INTRODUCTION TO SOIL SCIENCE LABORATORY MANUAL (SCHWYTER AND VAUGHAN)

Anna R. Schwyter & Karen L. Vaughan
University of Wyoming

LibreTexts™

University of Wyoming Libraries

Mountain Scholar

UW Open Education Resources (OER)

2020

Intro to Soil Science Laboratory Manual

Anna R. Schwyter

University of Wyoming, aschwyte@uwyo.edu

Karen L. Vaughan

University of Wyoming, karen.vaughan@uwyo.edu

Intro to Soil Science Laboratory Manual by Anna R. Schwyter & Karen L. Vaughan is licensed under a Creative Commons Attribution-NonCommercial-ShareAlike 4.0 International License.

Introduction to Soil Science Laboratory Manual

Anna R. Schwyter

Karen L. Vaughan

2020

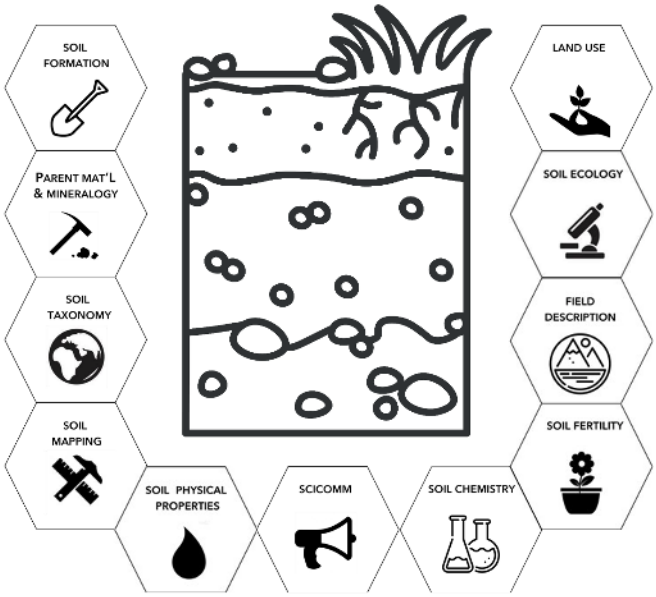

This text is disseminated via the Open Education Resource (OER) LibreTexts Project (https://LibreTexts.org) and like the thousands of other texts available within this powerful platform, it is freely available for reading, printing, and "consuming."

The LibreTexts mission is to bring together students, faculty, and scholars in a collaborative effort to provide an accessible, and comprehensive platform that empowers our community to develop, curate, adapt, and adopt openly licensed resources and technologies; through these efforts we can reduce the financial burden born from traditional educational resource costs, ensuring education is more accessible for students and communities worldwide.

Most, but not all, pages in the library have licenses that may allow individuals to make changes, save, and print this book. Carefully consult the applicable license(s) before pursuing such effects. Instructors can adopt existing LibreTexts texts or Remix them to quickly build course-specific resources to meet the needs of their students. Unlike traditional textbooks, LibreTexts' web based origins allow powerful integration of advanced features and new technologies to support learning.

LibreTexts is the adaptable, user-friendly non-profit open education resource platform that educators trust for creating, customizing, and sharing accessible, interactive textbooks, adaptive homework, and ancillary materials. We collaborate with individuals and organizations to champion open education initiatives, support institutional publishing programs, drive curriculum development projects, and more.

The LibreTexts libraries are Powered by NICE CXone Expert and was supported by the Department of Education Open Textbook Pilot Project, the California Education Learning Lab, the UC Davis Office of the Provost, the UC Davis Library, the California State University Affordable Learning Solutions Program, and Merlot. This material is based upon work supported by the National Science Foundation under Grant No. 1246120, 1525057, and 1413739.

Any opinions, findings, and conclusions or recommendations expressed in this material are those of the author(s) and do not necessarily reflect the views of the National Science Foundation nor the US Department of Education.

Have questions or comments? For information about adoptions or adaptions contact info@LibreTexts.org or visit our main website at https://LibreTexts.org.

This text was compiled on 05/19/2026

TABLE OF CONTENTS

Title Page

Licensing

1: Introduction to Soil Science and Soil Formation

- 1.1: Introduction
- 1.2: Activity 1 - Soil Formation
- 1.3: Activity 2 - Soil Horizons
- 1.4: Activity 3 - Soil Color
- 1.5: Activity 4 - Soil Texture
- 1.6: Activity 5 - Soil Structure

2: Parent Materials and Mineralogy

- 2.1: Introduction
- 2.2: Activity 2 - Minerals
- 2.3: Activity 2 - Rocks
- 2.4: Activity 3 - Weathering
- 2.5: Activity 4- Rocks to Parent Material

3: Soil Taxonomy

- 3.1: Introduction to Soil Taxonomy
- 3.2: Pre-Class Activity- Classified Location Exercise
- 3.3: Activity 1- Horizons and Characteristics
- 3.4: Activity 2 - Taxonomic Class

4: Soil Survey and Mapping

- 4.1: Introduction- Soil Survey Reports
- 4.2: What is a soil survey?
- 4.3: Challenges in soil surveying
- 4.4: Responsibility for soil surveys
- 4.5: Activity 1 - Using Web Soil Survey

5: Soil Physical Properties & Soil-Water Relations

- 5.1: Introduction- Soil Texture, Structure and Water Relations
- 5.2: Bulk Density, Porosity, Particle Density of Soil
- 5.3: Bulk Density
- 5.4: Particle Density
- 5.5: Porosity
- 5.6: Sampling
- 5.7: Soil-Water Relations
- 5.8: Soil Erosion
- 5.9: Activity 1 - Bulk Density and Porosity of Soil Cores
- 5.10: Activity 2 - Soil Moisture
- 5.11: Activity 3 - Soil Water Movement

- 5.12: Activity 4 - Infiltration Estimates and Available Water Calculations
- 5.13: Activity 5 - Effects of Soil Erosion

6: Science Communication

- 6.1: Introduction
- 6.2: Activity

7: Soil Chemistry

- 7.1: Introduction
- 7.2: Activity 1 - Soil Colloids
- 7.3: Activity 2 - Soil Charge
- 7.4: Activity 3 - Soil Charge Calculations
- 7.5: Activity 4 - Soil pH and Electrical Conductivity
- 7.6: Activity 5 - Reduction and Oxidation Reactions

8: Soil Health & Quality

- 8.1: Introduction to Soil Health
- 8.2: Activity 1 - Aggregate Stability
- 8.3: Activity 2- Nutrient Cycling and Availability
- 8.4: Activity 3 - Soil Nitrate
- 8.5: Activity 4 - Fertilizer Calculations

9: Field Lab

- 9.1: OVERVIEW
- 9.2: Climate
- 9.3: Relief
- 9.4: Time
- 9.5: Soil Classification
- 9.6: Soil Orders
- 9.7: Slope and Runoff
- 9.8: Soil Permeability
- 9.9: Laramie's Local Soils
- 9.10: Activity 1 - Soil Formation

10: Soil Ecology

- 10.1: Microbial Activity and the Carbon Cycle
- 10.2: Humus
- 10.3: Soil Microorganisms
- 10.4: Mineralization
- 10.5: Carbon/Nitrogen Ratio
- 10.6: Nitrogen Cycle
- 10.7: Major components of the Nitrogen Cycle
- 10.8: Activity 1 - Soil Incubation
- 10.9: Activity 2 - Carbon Dioxide
- 10.10: Activity 3 - Soil Nitrate-Nitrogen Analysis
- 10.11: Activity 4 - Decomposition Questions
- 10.12: Activity 5 - Winogradsky Columns

11: Makeup Lab: Land Use

- 11.1: Information and Activity

Index

Glossary

Detailed Licensing

Licensing

*A detailed breakdown of this resource's licensing can be found in **Back Matter/Detailed Licensing**.*

CHAPTER OVERVIEW

1: Introduction to Soil Science and Soil Formation

Learning Objectives

- To recognize the variety of sub-disciplines that exist within soil science
- To define “soil”
- To understand the primary soil forming factors and processes
- To learn the concepts and methods used for identifying and describing soils (color, structure, texture)

GOAL: To better understand the concepts of soil formation and applications of methods for describing and identifying soils

1.1: Introduction
1.2: Activity 1 - Soil Formation
1.3: Activity 2 - Soil Horizons
1.4: Activity 3 - Soil Color
1.5: Activity 4 - Soil Texture
1.6: Activity 5 - Soil Structure

Additional resources:

- Video link: Soils Sustains Life: https://youtu.be/vDL6F6GkAzI (length: 2:54)
- Video link: The Science of Soil: Why Study Soil? https://youtu.be/og3TUc9xQaE (length: 4:19)

This page titled 1: Introduction to Soil Science and Soil Formation is shared under a CC BY 4.0 license and was authored, remixed, and/or curated by Anna R. Schwyter & Karen L. Vaughan (UW Open Education Resources (OER)) via source content that was edited to the style and standards of the LibreTexts platform.

1.1: Introduction

Soil is the medium for plant growth at the land surface. Most of the world's food supply comes from plants growing in the soil (oceans and lakes supply some food). Soil serves as the habitat for thousands of species of animals, insects, and microorganisms. Soils support buildings, highways and other structures. Soils capture rainwater and melting snow to recharge our precious ground water. Soils also adsorb air and water pollutants. Soil microorganisms constitute the major component of life in the earth and cause many major biochemical transformations essential to our lives.

Throughout the duration of this course you wil dive deeper into the concepts and understandings of each of the following sub-disciplines, or focal areas of interest, within the discipline of soil science:

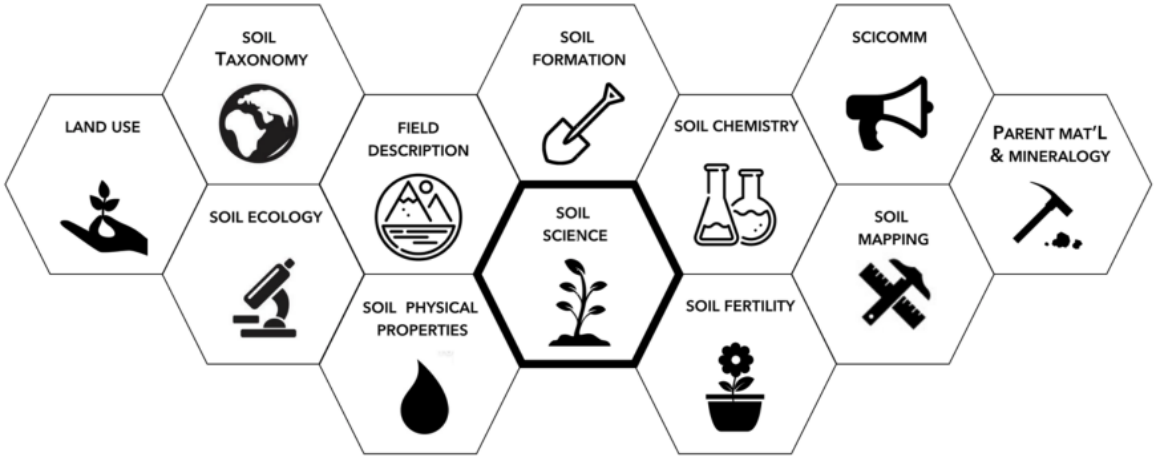

By nature of these sub-disciplines, soil science is inherently an interdisciplinary field. For this first lab, we will begin to learn a bit more about this interdisciplinary science by understanding the fundamentals of soil formation, soil characteristics, and the methods used for identifying and describing soils.

SOIL FORMATION

Soil is defined as: “a natural body comprised of solids (minerals and organic matter), liquid, and gases that occurs on the land surface, occupies space, and is characterized by one or both of the fol owing: horizons, or layers, that are distinguishable from the initial material as a result of additions, losses, transfers, and transformations of energy and matter or the ability to support rooted plants in a natural environment” (Keys to Soil Taxonomy, 2012).

Soils exist in three dimensions (**pedon**; 3 dimensional bodies) containing inorganic and organic material generally arranged into layers from the land surface downward into the earth. These layers of topsoil and subsoil (being roughly parallel to the ground surface) are called **horizons**. A two-dimensional vertical section of soil extending through these horizons downward to the parent material is called a **profile**.

Soils form in place based on five natural **soil forming factors**, including: 1) Climate; 2) Organisms; 3) Relief; 4) Parent Materials; And, 5) Time (Figure 1). Collectively, these five factors contribute to the function of soil formation (S), S= f (**Cl, O, R, P, T**…), otherwise known as **pedogenesis**. As the diagram suggests, soil formation is a continuum. As any one factor or influence changes, the final soil product will vary. An infinite number of combinations of soil forming processes yield many different soil properties.

Understanding the role of each soil forming factor allows us to understand or predict soil occurrence.

These five soil forming factors also work through four important **soil forming processes** (Table 2), considered in the following four groups: 1) Additions; 2) Losses; 3) Transformations; And, 4) Translocations.

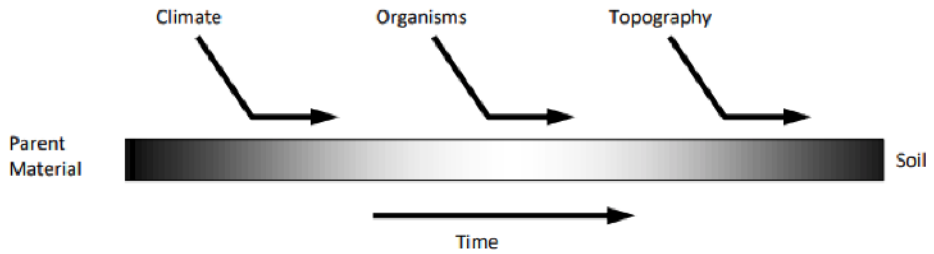

Figure 1. "The soil forming factor continuum" by Colby J. Moorberg and David A. Crouse is licensed under CC by 4.0

Table 1. Examples of soil forming factors

Soil Forming Factor	Example
Climate	Temperature, precipitation, evaporation
Organisms	Vegetation, fauna, human influence
Relief	Slope, erosion/sedimentation, hillslope position
Parent Material	Mineralogy, bedrock, chemical species present, texture
Time	Change of boundary conditions

Table 2. Examples of soil forming processes

Soil Forming Process	Example
Additions	Organic matter, fertilizers, dust deposition, other mineral soil
Losses	Movement of soil via wind or water, OR chemical compounds leached, eroded, or harvested from the soil
Transformations	Chemical or physical weathering of soil particles or components
Translocations	Movement of soil components (organic or mineral) between horizons within a soil profile

While these factors and processes contribute to the natural formation of soil, it is also acknowledged that soil formation is likewise impacted by what is referred to as, "the human factor". As such, we all play a part in the formation, conservation, and protection of soil. As we manipulate the earth's surface, we can either improve or degrade our quality of lives. Regardless of the effect, we become responsible for the stewardship of our land – and good land stewardship requires us to understand the properties and processes of soils.

SOIL MORPHOLOGY, PROPERTIES, and IDENTIFICATION

Soils form from parent materials, which are acted upon by the four basic soil forming processes aforementioned. These four processes aid in distinguishing soils from layers of materials deposited by geologic processes. The extent to which these four basic processes occur help differentiate soils.

Soil Horizons

The horizon is different from the layers above and below it in the same soil. In total, there are five major soil horizons, called master soil horizons, which are distinguishable by their color, composition, and other characteristics.

O horizon

An O horizon consists of organic material deposited on top of the mineral surface. Often, various stages of decomposition can be recognized, with fresh material at the surface and decayed material below.

Most soils do not have an O horizon or, at best, they have only a thin O horizon either because soil microorganisms rapidly decompose the organic material, or very little organic material is deposited on the soil surface due to a lack of vegetative growth.

However, some forest soils may have an appreciable accumulation of organic matter as an O horizon. This may consist of broadleaf litter or more commonly as a thick layer of pine needles.

A horizon

The A horizon is the mineral horizon characterized by a dark color caused by an accumulation of organic matter (humus) mixed into the mineral soil. A horizons usually have high biological activity. A horizons can be leached of clay, but remain dark because of organic matter replenishment. Most soils have an A horizon. A few soils may lack an A horizon either because they are very young or they have been severely eroded.

E horizon

The E horizon is light in color compared to the A horizon above or B horizon below. The E horizon is the zone of maximum eluviation. Eluviation is the slow removal of fine clay and organic material by water percolating down through the soil. The E horizon is usually found in sandy soils receiving high rainfall under forest vegetation.

B horizon

The B horizon is the mineral horizon usual y occurring beneath an A or an E horizon and above a C

horizon. The B horizon is the zone of maximum illuviation. Illuviation is the process of accumulation of clay, iron or aluminum oxides, humus, or some combination of these materials weathered in place or leached by eluviation from the overlying horizons. Some soils lack a B horizon because they are too young for materials to have had time to move downward by percolating water flow.

C horizon

The C horizon is the layer of unconsolidated earth materials that exhibit the least evidence of physical disintegration, chemical decomposition and root development. The C horizon is weathered parent material from which the A, E, and B horizons can develop. The parent material for any horizon is the material from which that horizon developed.

R layer

The R layer consists of the underlying hard bedrock material. Granite, basalt, sandstone, and limestone are common examples of R layer material. R layers are not considered soil.

Subdivisions/Subscripts

In the field, the master soil horizons may be subdivided to note special soil features. Some of the most common features are the effects of plowing (Ap), the development of a new B horizon (Bw), water-logging (Bg or Cg), accumulation of carbonates (Bk) or clay (Bt), and soft rock parent material (Cr). An AB

symbol represents a horizon between the A and the B, which has some properties of each horizon.

Soil color

Color is one of the most important physical characteristics of soil. It can be used to differentiate among various soil horizons (layers of soil), to estimate organic matter content, to evaluate the soil drainage class, and to assess many other soil conditions. The Munsell Color System, as approved by the National Bureau of Standards, is used to identify soil color. The Munsell Color System has been developed internationally to describe any color anywhere. It has nothing to do, directly, with soil.

In the Munsell Color System, three component parts describe the colors: **hue, value, and chroma** (always designated in exactly this order). Hue is the spectral variable. Hue represents one of the dominant colors of the rainbow, for example, yellow or red. Value represents the relative darkness or lightness of the color. Chroma represents the purity, strength, or saturation of a color. Colors having zero chroma are gray to black.

A Munsell Color Book is used to identify soil color. The book's pages display chips of various colors, which are matched as closely as possible to the soil color in the field. Each page represents a different Hue. Common pages used for soil studies include 10R, 5YR, 10YR, and 2.5Y hues. The letter R represents Red and the letter Y represents Yellow. Red soils are common when iron oxides are abundant in the soil profile. The pages go from 2.5R (pink) and 5R (yel owish pink), both of which are seldom used, to 7.5R (reddish orange) to 10R (dark reddish orange; commonly associated with iron oxides). The hues, which consist of increasing

amounts of yellow mixed with red, are designated as 2.5YR (brownish orange), 5YR (strong brown), 7.5YR (moderate brown), and 10YR (medium brown). As the red is eliminated, more yellow is emphasized with 2.5Y (light olive brown) and 5Y (moderate olive). For a few strongly flooded soils, which have no free oxygen gas, the colors are very dark blue, dark greenish, dull bluish gray, or black.

On each page of the Munsell Color Book, the value is listed in increasing numerical order from the bottom to the top of the page (vertical y). The lower rows at the bottom of the page have low values and are dark colored. The upper rows at the top of the page have higher values and are lighter colored.

The columns of color going from left to right (horizontally) give the chroma. The left columns (low chroma) represent gray or pale colors. The right columns (high chroma) are more deeply or brightly colored. Thus, a single hue has many combinations of a value and a chroma.

The Munsel Color Notation consists of the color name folowed by the sequence, hue, value/chroma (i.e. 5 YR 3/2). A brown soil is designated by the notation 10YR 5/3. The name of the color is found on the page facing the color chart.

Soil Texture

The solid portion of soils consists primarily of mineral particles (usually more than 95 % by mass) mixed with organic materials. These mineral particles are divided into coarse fragments greater than 2 mm in diameter (termed gravel), and finer particles less than 2 mm in diameter.

The fine particle fraction is further divided into arbitrary size classifications known as soil separates. The three soil separates are sand, silt, and clay. These three separates remain essentially constant during your lifetime in any given soil. The size classification of these soil separates is shown in Table 3.

Table 3. Size Classification of Soil Separates

Particles	Diameter (mm)
Sand	2.0 to 0.05
Silt	0.05 to 0.002
Clay	less than 0.002

Soil texture is defined by the relative proportion of sand, silt, and clay. Soil texture remains constant for any given soil during your lifetime. Because texture is limited to sand, silt and clay, other soil components, including water, air, organic matter, and inorganic materials larger than 2 mm, are excluded, although gravels and cobbles may be included as modifiers to the textural name. Texture applies only to mineral soils. Organic soils such as peat and muck, do not have texture.

Percentage is determined by multiplying the decimal fraction of two numbers by 100 %. The symbol % means “per cent” which can be translated mathematical y to mean “per” = to divide by the number, and “cent” = 100. Thus % means “divide by 100" which is the same as to multiply by (1/100). Thus, to multiply by 100 % is the same as multiplying by 100 x (1/100) which equals 1.0. Therefore, multiplying any decimal fraction by 100% does not change the value of the original decimal fraction because it is the same as multiplying by 1.0. Note, it is incorrect to multiply only by 100. The correct form is to multiply by 100%, not by 100 alone.

The percentages of sand, silt and clay are calculated from laboratory data according to the following definitions:

$$\%\text{Sand} = \frac{\text{mass (g) of sand}}{\text{mass (g) of sand} + \text{silt} + \text{clay}} \times 100\%$$

$$\%\text{Silt} = \frac{\text{mass (g) of silt}}{\text{mass (g) of sand} + \text{silt} + \text{clay}} \times 100\%$$

$$\%\text{Clay} = \frac{\text{mass (g) of clay}}{\text{mass (g) of sand} + \text{silt} + \text{clay}} \times 100\%$$

Remember, percent (%) is defined as parts per hundred (pph).

Example: The following data were obtained about a soil sample:

mass of sand = 15.5 g

mass of silt = 17.0 g

mass of clay = 17.5 g

total mass of dry inorganic soil < 2 mm in diameter = 50.0 g

$\%Sand = \frac{15.5\ g\ sand}{50.0\ g\ dry\ soil} \times 100 = 31.0\%$ = 31.0 pph sand in soil

$\%Silt = \frac{17\ g\ silt}{50.0\ g\ dry\ soil} \times 100 = 34.0\%$ = 34.0 pph silt in soil

$\%Clay = \frac{17.5\ g\ clay}{50.0\ g\ dry\ soil} \times 100 = 35.0\%$ = 35.0 pph clay in soil

Soils having similar textures can be grouped into classes of soils having similar characteristics and behavior. Twelve soil textural classes are given in the textural triangle (Fig.2). The textural classes provide a way to express soil texture without referring specifically to the percentages of each separate.

When any two of the three percentages are known, the soil textural class can be determined from the triangle. This is why only two axes are required to plot the textural class for any given soil.

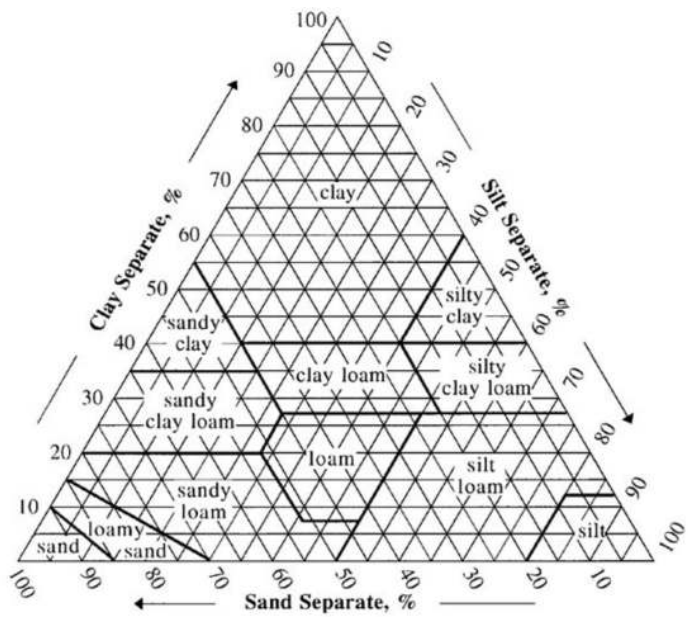

Figure 2. USDA Soil Survey Division Staff, SoilTextureTriangle, marked as public domain, more details on Wikimedia Commons

Locate the percent sand along the bottom (horizontal axis) of the triangle. Locate the percentage of clay along the left-hand axis of the triangle. Move upward from the sand percentage and to the right of the clay percentage until these two projected lines intersect. This point of intersection corresponds to the textural class corresponding to this particular portion designated on the triangle.

If a soil falls on the boarder of a texture (in-between textures), soil scientists have adopted the convention of adding 1% clay to the actual value and reporting the textural class name associated with this 1% clay addition. The reason for making this decision is based upon the fact the clay content is the most difficult to analyze of the three soil separates.

A soil's textural class may be determined by several methods that range from quick and simple field tests to more involved laboratory techniques. The "field" or “feel" method is the simplest to conduct, but it is the least accurate due to differences among individuals. The feel method is qualitative more than quantitative. The feel method involves moistening the soil, kneading the moistened soil mass with your fingers to mix the particles thoroughly, and feeling the particles to determine the texture. The accuracy of estimating soil texture by this method improves with experience. Examples of the soil textures using the feel method are provided in descriptive form.

Determining the Soil Textural Class by the "Feel/Field" Method

The soil textural class can be estimated by observing and feeling the soil under dry, moist, and wet conditions. The size range of the separates and their feel when moist are listed in Table 4.

Table 4. USDA soil particle size ranges and feel under moist conditions.

Soil Separate	Diameter (mm)	Feel: moist condition
Sand	2.0 – 0.05	Gritty
Silt	0.05 – 0.002	Smooth, velvety, buttery
Clay	< 0.002	Sticky, plastic

Soil Structure

Soil structure is the arrangement of the individual soil particles into aggregates which are separated by surfaces of weakness. The structural aggregates, which are called peds, comprise several types depending on their shape: granular, blocky, prismatic, columnar, and platy. The definition has two parts: aggregation and separations. If a soil's condition does not satisfy both parts of the definition, it is structureless. Thus, not all soils have structure. The two structureless conditions are single grained (having no aggregation) and massive (having no separation patterns).

Granular soil structure… occurs most commonly in the A horizon. Granular structure forms as a result of the soil humus attracting strongly to the surface of the silt and clay particles of the soil. This attraction multiplied over many years creates aggregates. The binding between the humus of one aggregate and the next is less than the binding of the humus to the silt and clay particles. Consequently, the aggregates act independently. The humus causes the individual aggregates to arrange much as marbles would in a random arrangement with many voids or pore spaces between the aggregates. These pores allow for rapid water permeability. These same pores permit rapid air movement and allows for easy root penetration. Granular structure is optimized in the presence of the very fine roots of grasses. Granular structure can form within 50 to 100 years of exposing new parent material.

Blocky soil structure… is most commonly found in the B horizon. Blocky structure occurs as a result of the long, slow process of clay particles moving from the A horizon (eluviation) and leaching into the B horizon (illuviation). As these clay particles accumulate in the B horizon, they settle inside existing pores. Consequently, the soil pores become lined with these il uviated clay particles. With time, more of these pores become fil ed with clay, thus squeezing the pores tighter together and reducing water permeability, air movement and ease of root penetration. These individual aggregates take on a block-like appearance.

Prismatic soil structure… usually forms after blocky structure has been formed in the B horizon of a soil. Prismatic structure is usually associated with soils which have formed in semiarid and arid environments where the soil dries out to a considerable depth during some period of the year. This pul s the blocks apart and eventually leads to a whole group of blocks acting as a vertical prism. These prisms form zones of weakness between the prisms vertically. During the first rains of the wet season, water rapidly moves down along these prisms, but as the soil becomes wetter, the prisms expand, fil ing the voids between the prisms resulting in moderate water permeability. This causes restricted air movement and reduces the ease of root penetration through this horizon.

Columnar soil structure… occurs in the B horizon of some soils in semiarid and arid regions. Columnar structure only occurs where the soil has a high concentration of sodium on the soil cation exchange sites. The columns form in a similar manner to the formation of the soil prisms. However, as the soil continues to form, the sodium disperses the clays from the surface of the prism and causes these clays to move down the edges of the prisms. This causes a strong degree of sealing of the prisms resulting in slow to very slow water permeability, restricted air movement, and very difficult root penetration. Few plants can grow in such soil.

Platy soil structure… is relatively rare in native soils. Platy structure is most commonly formed as a result of compaction by vehicles, livestock, and humans. Platy structure is most commonly found in the A horizon of agricultural, urban, forest, and range soils under intensive management. The key factor is relatively horizontal layers of these soil aggregates.

Single grain soil structure… occurs where no grain is connected to any other grain. The best example is dune sand. Sands and silts in an alluvial (river deposit) or loess (wind deposit) may have a single grain structure. Single grain structure is a lack of structure since no true aggregates exist.

Massive soil structure… is really the lack of structure. As the term massive suggests, this is simply a mass of soil particles with no apparent repeating shape across the horizon. Massive structure usually occurs in the C horizon but may occur in other horizons if very little soil horizon development has occurred.

Soil structure is the second most important soil physical property. It influences water infiltration and percolation, aeration, erosion resistance, and ease of root penetration. The soil's structure is controlled by the soil's texture, organic matter content and form of organic compounds, plant and animal activity, and clay mineral content, and chemistry. Some common soil structure cementing agents are humus, aluminosilicate clay, iron and aluminum oxide clay, silica, and carbonates. Often, soil structure is easily altered by human activities such as tillage or compaction.

Soil structure and texture interact to control other soil properties. In Table 4, soil structure has a greater influence in fine textured soils than in coarse textured soils. This indicates structure is more prominent in fine soils than in coarse soils.

This page titled 1.1: Introduction is shared under a CC BY 4.0 license and was authored, remixed, and/or curated by Anna R. Schwyter & Karen L. Vaughan (UW Open Education Resources (OER)) via source content that was edited to the style and standards of the LibreTexts platform.

1.2: Activity 1 - Soil Formation

Name: _____

Section: _____

Student ID#:_____

Read through and complete the following activity and questions. All questions should be answered and completed labs are due at the end of the laboratory period. No late work will be accepted.

1) As best you can and in your own words, define, "soil."

2) Refer to the soil monoliths identified by your instructor at the front of the classroom. Using these monoliths for reference, please draw an interpretive diagram of soil by incorporating the terms PEDON, HORIZON/LAYER, and PROFILE together into one image. Label each of these key terms/parts on your diagram.

3) Please fill in the following blanks and answer the questions referring to each of the soil forming factors indicated below:

Soil forming factor	Contributing element
Climate	1. _____ 2. Precipitation 3. Evaporation
Organisms	1. Human influence 2. _____ 3. _____
Relief	1. _____ 2. Erosion/sedimentation on the landscape
Parent Material	Give two examples of a parent material type: 1. _____ 2. _____
Time	Why would it be important to assess the formation of soil over time?

4) Indicate whether each of the following examples represents an ADDITION, LOSS, TRANSFORMATION, or TRANSLOCATION within the soil. Note: some answers are used more than once. (6 points)

a. Clay particles are moved by water moving from an upper E horizon to a lower B horizon within a soil profile…
b. The forces of nature have acted upon the soil over time, weathering sand sized particles into smaller clay sized particles within the top horizon of a soil profile…
c. Surface mineral soil material is washed away by the force of a monsoon…
d. Organic material is mixed into the upper 20cm of the soil profile by the activity of burrowing worms…
e. Dust particles fall on to the surface of a soil…
f. Nitrate is leached from the A horizon within the soil profile…

This page titled 1.2: Activity 1 - Soil Formation is shared under a CC BY 4.0 license and was authored, remixed, and/or curated by Anna R. Schwyter & Karen L. Vaughan (UW Open Education Resources (OER)) via source content that was edited to the style and standards of the LibreTexts platform.

1.3: Activity 2 - Soil Horizons

Name: _____

Section: _____

Student ID#:_____

Read through and complete the following activity and questions. All questions should be answered and completed labs are due at the end of the laboratory period. No late work will be accepted.

1) What do the subscripts p, r, t, and k indicate when applied to soil horizons? (Refer to red field guidebook)

p =

r =

t =

k =

2) Which master soil horizon or layer is each subscript associated with in soils?

Horizon or layer

p _____

r _____

t _____

k _____

3) How does the presence of iron oxides affect soil color?

4) *Which horizon (A, E, or B) is usually first to form as the soil develops?*

This page titled 1.3: Activity 2 - Soil Horizons is shared under a CC BY 4.0 license and was authored, remixed, and/or curated by Anna R. Schwyter & Karen L. Vaughan (UW Open Education Resources (OER)) via source content that was edited to the style and standards of the LibreTexts platform.

1.4: Activity 3 - Soil Color

Name: _____

Section: _____

Student ID#:_____

Read through and complete the following activity and questions. All questions should be answered and completed labs are due at the end of the laboratory period. No late work will be accepted.

1) Obtain a Munsell Color Book.

2) Become familiar with the hue, value, chroma, and the name designations.

3) Turn the pages until the page (hue) approximates the overall soil color.

4) Determine the color of the soil samples on the laboratory bench. Record both the Munsel color notation and color name on the appropriate line below.

5) Compare the color chips in the Munsell Color Book with the color of the dry soil.

Dry Soil	*Munsel Color Notation*	*Color Name*
A		
B		
C		

6) Moisten the soil and determine its Munsell Color in this new moisture condition. Record results on the appropriate line below.

Moist Soil	*Munsel Color Notation*	*Color Name*
A		
B		
C		

1) In what way did wetting each soil affect its color?

2) Which color notation (hue, value or chroma) is most affected by wetting the soil?

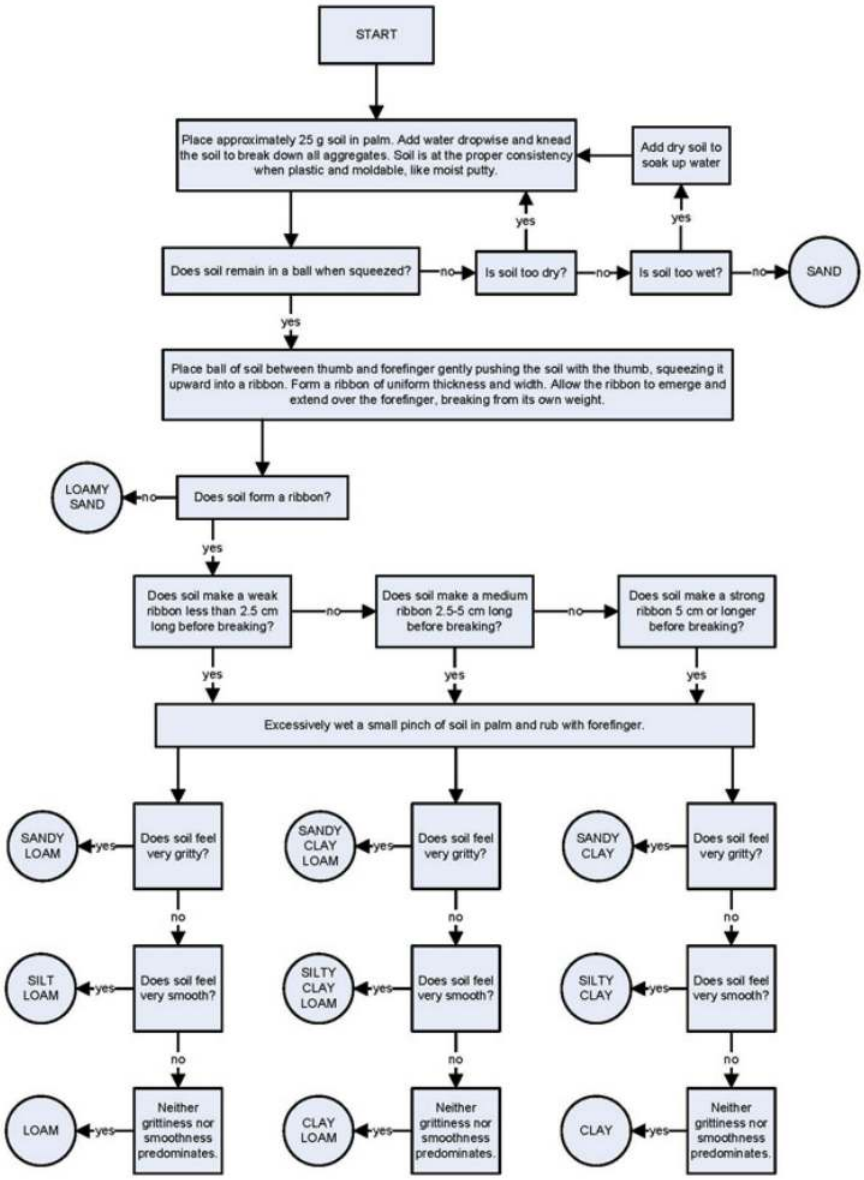

USDA-NRCS, Texture by Feel, marked as public domain, more details on Wikimedia Commons

This page titled 1.4: Activity 3 - Soil Color is shared under a CC BY 4.0 license and was authored, remixed, and/or curated by Anna R. Schwyter & Karen L. Vaughan (UW Open Education Resources (OER)) via source content that was edited to the style and standards of the LibreTexts platform.

1.5: Activity 4 - Soil Texture

Name: _____

Section: _____

Student ID#:_____

Read through and complete the following activity and questions. All questions should be answered and completed labs are due at the end of the laboratory period. No late work will be accepted.

Known Soil Samples to be Identified:

Sample	Soil Characteristics (grittiness, stickiness, ribbon length, etc.)	USDA Textural Class
1		
2		
3		

Unknown Soil Samples to be Identified:

Sample	Soil Characteristics (grittiness, stickiness, ribbon length, etc.)	USDA Textural Class
1		
2		

1) Define soil texture.

2) What differences do you notice between the feel of the sand and the feel of the silt separates?

3) Which soil separate will settle most rapidly to the bottom of the lake?

4) Practice determining the textural class for these soils:

Soil Sample	Sand % by mass	Silt	Clay	USDA Soil Textural Class
A	65	25	10	Sandy Loam
B	40	40	20	
C	50	25	25	
D	10	70	20	
E	40	10	50	
F	17	46	37	

5) What is the lowest clay percentage allowed for a texture to be classed as:

clay =	clay loam =
sandy clay loam =	sandy clay =

6) What is the lowest silt percentage allowed for a texture to be classed as:

loam =	silt loam =	silt =

7) A dry soil sample weighing _25_ grams in total contains _8_ grams of sand, _15_ grams of clay, and the remainder is silt. Calculate the percentages of sand, silt and clay and determine the soil's textural class. Show the appropriate units and complete setup for each calculation of this problem.

% Sand =

% Silt =

% Clay =

USDA Textural Class =

This page titled 1.5: Activity 4 - Soil Texture is shared under a CC BY 4.0 license and was authored, remixed, and/or curated by Anna R. Schwyter & Karen L. Vaughan (UW Open Education Resources (OER)) via source content that was edited to the style and standards of the LibreTexts platform.

1.6: Activity 5 - Soil Structure

Name: _____

Section: _____

Student ID#:_____

Read through and complete the following activity and questions. All questions should be answered and completed labs are due at the end of the laboratory period. No late work will be accepted.

1) Draw a picture of the various soil structures on display.

Granular	Blocky	Prismatic	Columnar
Platy	Single Grain	Massive	

2) How can granular soil structure be distinguished from blocky structure?

3) How are soil texture and structure affected (if at all) by soil compaction?

Texture is:

Structure is:

4) Name five cementing agents important in the formation of soil structure.

a.

b.

c.

d.

e.

5) Which type of soil structure is commonly found in the A horizon of a non-disturbed grassland soil? Why?

REMINDERS/Assignments for next week's lab:

a) Study for pre-lab Quiz on material from Lab #2: Soil Parent Materials and Mineralogy.

b) Your lab instructor will give you a soil sampling "kit" in order to take soil samples from a location of your choice in Laramie, WY - your backyard should do! You wil use this sampling "kit" to take your sample

1. A bulk density (BD) soil sample (using known volume metal BD ring stored in small sample bag)

2. Instructions for collecting bulk density measurements using core method: https://www.youtube.com/watch?v=E7BSZrJ-TDw&feature=youtu.be&t=1341

   i. Video should begin at 22:20, and watch through 25:28.

   ii. Record the ring number and ring volume on your sample bag

   iii. You only need to take 1 sample; this video instructs taking 3 samples per horizon.

3. Remember to record the coordinates (latitude, longitude) of this general location for reference. Please bring this soil sample to next week's lab for preparation.

This page titled 1.6: Activity 5 - Soil Structure is shared under a CC BY 4.0 license and was authored, remixed, and/or curated by Anna R. Schwyter & Karen L. Vaughan (UW Open Education Resources (OER)) via source content that was edited to the style and standards of the LibreTexts platform.

CHAPTER OVERVIEW

2: Parent Materials and Mineralogy

Learning Objectives

- To understand the various types of soil parent materials that exist
- To identify the physical and chemical properties of common minerals and rocks
- To understand be able to recognize important soil weathering processes such as hydrolysis, carbonation, and redox reactions
- To recognize what different weathered geologic material looks like at various stages of weathering from rock, to parent material, to soil.

GOAL: To understand the importance of soil mineralogy and the fundamentals of soil parent materials and they play in soil formation.

2.1: Introduction

2.2: Activity 2 - Minerals

2.3: Activity 2 - Rocks

2.4: Activity 3 - Weathering

2.5: Activity 4- Rocks to Parent Material

Additional resources:

- Bil Nye The Science Guy, “Rock and Soil” - https://www.youtube.com/watch?v=34mquU3nBfY (length: 23:04)
- “Children’s” learning lesson on weathering- https://www.youtube.com/watch?v=R-Iak3Wvh9c (length: 4:05)

This page titled 2: Parent Materials and Mineralogy is shared under a CC BY 4.0 license and was authored, remixed, and/or curated by Anna R. Schwyter & Karen L. Vaughan (UW Open Education Resources (OER)) via source content that was edited to the style and standards of the LibreTexts platform.

2.1: Introduction

Soils don't simply *exist* on the landscape; rather they grow, develop, erode, and slowly transform into other soils through time—a group of processes known collectively as pedogenesis. Pedogenesis begins with *parent material*, the stuff from which soils form. Although a small minority of soils develop in organic deposits, most derived from inorganic parent materials acted upon by *additions*, *losses*, *translocations*, and *transformations*

A major type of transformation is **weathering of geologic parent materials**. All mineral soils develop from the rocks and minerals of the earth's crust. Through weathering, minerals and rocks physically **disintegrate into smaller particle sizes**, and **chemicaly decompose into altered chemical and mineralogical products**. However, the original rock material commonly is transported or reworked by some mechanism before a soil is formed. Variations in the history of the initial material lead to a **range of types of soil parent materials** (Table 1). Additional y, these **weathering processes release elements**, including plant and animal nutrients, and convert primary minerals into clays.

Table 1. "Summary of transported parent materials" by Colby J. Moorberg and David A. Crouse is licensed under CC by 4.0

Mode of transportation	Mode of deposition	Name of parent material
Gravity	Gravity	Colluvium
Water	Stream	Alluvium
	Lake	Lacustrine
	Ocean	Marine
Ice	Ice	Till, moraine
	Meltwater	Outwash (alluvium, lacustrine)
Wind	Wind	Loess, dunes

These parent materials continue to weather over time based on a function of soil forming factors and processes. Another major consideration for weathering potential of soil parent materials is hillslope position. Hillslope position references where on the landscape a soil is located (Figure 1). Hillslope positions essential y delegate the degree of slope and interaction with the groundwater table for the soils of a specific position location. These relationships between soil and slope, or the groundwater table, greatly influence weathering processes over time, increasing both physical and chemical weathering, depending on hil slope position.

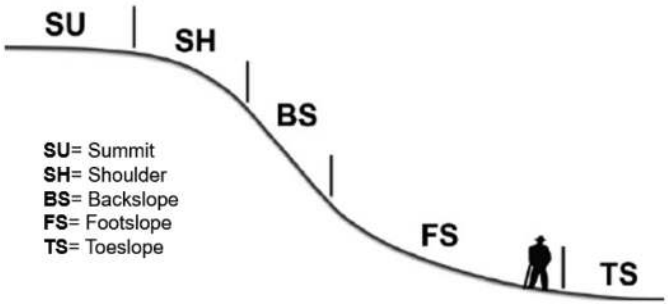

Figure 1. "Hill slope position across a landscape" Positions higher up and with a higher slope wil have better drainage and less interaction with the groundwater table, while those positions that are lower lying on the landscape have a lower slope and decreased drainage. Wysocki et al., 2000 and Schoeneberger et al., 2012.

MINERALS

In geology and soil science, a mineral is a naturally occurring, inorganic, crystalline solid having a definite chemical composition and predictable physical properties. Of the six criteria included in this definition, three (naturally occurring, inorganic, and solid) need little elaboration; the remaining three are explained in succeeding paragraphs.

Crystalinity of Minerals

Crystalline means that a mineral's atoms are arranged in an orderly and repeatable manner; they are not random. The atomic arrangement, which varies among mineral groups, contributes to several of the mineral's physical properties, including hardness and cleavage, which are explained under "Physical Properties of Minerals." In contrast, a substance having randomly arranged atoms is amorphous, or noncrystalline, and as such is not considered to be a mineral. A good example of amorphous material is the rock obsidian, a form of volcanic glass.

Chemical Composition of Minerals

Minerals are made up of one or more elements, which give rise to definite chemical compositions (Figure 2). Although chemical formulas are precisely fixed for some minerals (e.g., quartz is SiO2 and orthoclase is KAlSi3O8), they can vary within a narrow range for other minerals (e.g., plagioclase ranges from NaAlSi3O8 to CaAl2Si2O8 because Na+ and Ca2+, which substitute for each other, occur together in varying proportions in the same mineral). Also, no matter how precise the formula, irregularities occur in nature, allowing impurities to sneak in. Note the elements and minerals in Figure 2. What do the four minerals have in common?

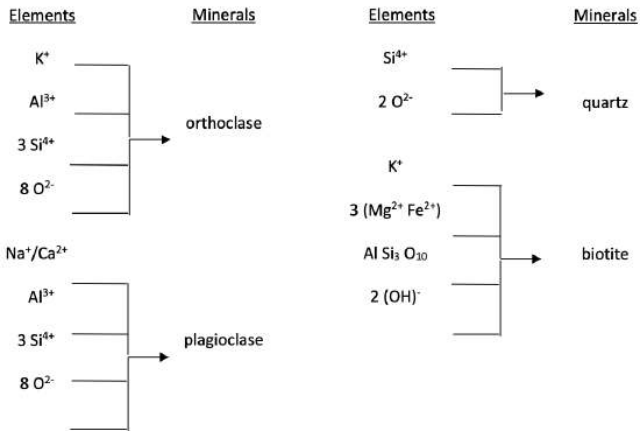

Figure 2. Elemental composition of four common minerals important in soil formation.

On a mass basis, nearly three-fourths of Earth's crust is made up of only two elements: oxygen and silicon; and on a volume basis, these two elements constitute more than 90%! The next six most common elements bring the totals to about 98.5 percent by mass, and to nearly 100 percent by volume (Table 2). Obviously, very little room is left for the remaining 100 or so elements, including most plant nutrients, found in the crust. How is it then that soils, nearly all of which derive ultimately from crustal weathering, can supply enough nutrient elements for nearly all terrestrial life, including three-fourths of humanity's food supply? Your work in this laboratory exercise should help you begin to understand and appreciate the answer to this question.

Table 2. The eight most common elements in the Earth's crust.

Element	Ionic Formula	Mass Percent	Volume Percent
Oxygen	O^{2-}	46.60	91.97
Silicon	Si^{4+}	27.72	0.80
Aluminum	Al^{3+}	8.13	0.77
Iron	Fe^{2+} & Fe^{3+}	5.00	0.68
Calcium	Ca^{2+}	3.63	1.48
Sodium	Na^{+}	2.83	1.60
Potassium	K^{+}	2.59	2.14
Magnesium	Mg^{2+}	2.09	0.56

Mineral Classification Based on Chemical Composition

Most minerals are grouped into seven classes based on their fundamental anionic unit (Table 3). (A few other classes exist, but these can be ignored for this laboratory). Of these, the silicates are by far the most common; nonetheless weathering products of others can be equal y vital.

Table 3. Classification and composition of selected minerals important in soil science.

Mineral Class	Example	Chemical Composition (specimen #)	Comments
Sulfides	1) pyrite 2) sphalerite	FeS_2 (19) ZnS (17)	readily oxidized in moist soils
Oxides	hematite	Fe_2O_3 (15)	readily oxidized, producing red colors
Halides	1) halite 2) sylvite	NaCl (18) KCl	rock salt; sometimes found in desert soils
Carbonates	1) calcite 2) dolomite	$CaCO_3$ (13) $CaMg(CO_3)_2$	1) calcareous; reacts to acid; weathers easily in moist soils 2) calcareous; less reactive than calcite
Sulfates	gypsum	$CaSO_4 \cdot 2H_2O$ (20)	a common agricultural amendment; sometimes found in desert soils
Phosphates	apatite	$Ca_5(PO_4)3(F,Cl,OH)$ (8)	the only significant source of phosphorus
Silicates	olivine	$(Mg, Fe)2SiO_4$	most easily weathered of the silicates
	pyroxene: augite	$(Ca, Na)(Mg, Fe, Al)(Si, Al)2O_6$ (12)	susceptible to oxidation and hydration
	amphibole: hornblende	$(Ca,Na)2\text{-}3(Mg,Fe,Al)5Si_6(Si,Al)2O_{22}(OH)2$ (11)	susceptible to oxidation and hydration, but more resistant than augite
	micas: 1) muscovite 2) biotite	1) $KAl_2(AlSi_3O_{10})(OH)2$ (6) 2) $K(Mg, Fe)3(AlSi_3O_{10})(OH)2$ (7)	1) soft, but strongly resists chemical weathering 2) soft; weathers more easily than muscovite
	feldspars: 1) orthoclase 2) plagioclase	1) $KAlSi_3O_8$ (9) 2) $Na(AlSi_3O_8) \rightarrow Ca(Al_2Si_2O_8)$ (10)	Most common minerals 1)hard, resistant 2)hard, weathers
	quartz	SiO_2 (4)	hard and most resistant to weathering

Physical Properties of Minerals

Color: Minerals exist in nearly every color, and although color is easy to determine, it might not be reliable for identifying a mineral. For example, pyrite is nearly always brassy yellow, but quartz can range across several hues, values, and chromas from colorless to white, pink, purple, and gray. In some minerals, color can be strongly influenced by impurities.

Luster: independent of a mineral's color and determined by the nature of light reflected from a mineral's surface. Most lusters fall into two main groups: metallic and nonmetallic. Metallic lusters are typical of minerals that strongly absorb light, and as a result are opaque, even in very thin pieces. These minerals tend to look like metals, even though their surfaces might range from shiny to dull. Nonmetallic lusters are seen in minerals that allow light to pass through thinly cut slices. Surfaces of nonmetallic minerals might be brilliant like diamond, glassy like quartz, waxy like serpentine, or earthy like clay.

Cleavage and fracture: Cleavage is a mineral's tendency to break along certain predictable directions when the mineral is struck by a hammer. The resulting cleavage surfaces might be smooth and distinct, or they might be rough and indistinct, depending on the type of mineral. Different minerals also cleave along different directions and at different angles, depending on the type and orientation of atomic bonding. Although the number of possible cleavage directions is 1, 2, 3, 4, or 6, we will focus only on minerals that have 1 (e.g., biotite), 2 (e.g., orthoclase), and 3 (e.g., calcite) directions (Figure 3). Some minerals, when hit by a hammer, do not break along predictable planes: they simply shatter in any direction. These minerals are said to fracture, rather than cleave. Quartz is a good example of a mineral that exhibits fracture.

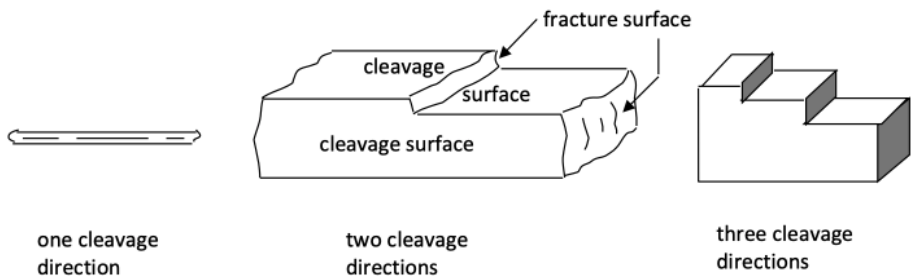

Figure 3. Examples of mineral cleavage.

Hardness: Hardness is determined by the resistance of a mineral's surface to scratching by various instruments of known hardness. It is judged by the Mohs hardness scale, which uses certain reference minerals ranked from 1 (soft) to 10 (hard): (see next page

Mohs Hardness Scale

1. Talc (easily "scratched" by rubbing between fingers, giving a soapy feel)
2. Gypsum (easily scratched by a fingernail)
3. Calcite (same hardness as a penny)
4. Fluorite
5. Apatite (a bit softer than a pocket knife blade)
6. Orthoclase (harder than a knife blade, but slightly softer than glass)
7. Quartz (harder than both a knife blade and glass)
8. Topaz
9. Corundum
10. Diamond

(Soil minerals are very rarely harder than 7)

Essential elements for plants and animals

Essential elements are those that organisms need to grow and complete their life cycles. For plants, sixteen elements are universal y recognized as essential; nonetheless research conducted in the late 20th century suggests that the number is eighteen or perhaps even greater. We wil consider that plants require eighteen elements (Table 4), although you should understand that many plants, depending on their species, take up more than they seem to need.

A mnemonic phrase can help you memorize the 18 elements:

C HOPKNS CaFe Mg B Mn CuZn Cl CoMo Ni

Translated, this reads "C Hopkns café, managed by "mine" cousins Clyde, Como, and Nicky."

Note that of the eight most common elements in Earth's crust, only five, oxygen, iron, calcium, potassium, and magnesium, are among the 18 essential elements (Table 4); and the first of these, oxygen, is supplied by O2 in the atmosphere, **not** by weathering of minerals and rocks. Of the thirteen remaining essential elements, hydrogen comes from water, carbon comes from carbon dioxide (CO2) in the atmosphere, and nitrogen is maintained by cycling of organic matter. (Nitrogen first is made available to plants by fixation from the atmosphere.) The remaining ten elements, phosphorus, sulfur, boron, manganese, copper, zinc, chlorine, molybdenum, nickel, and cobalt derive from weathering of minerals and rocks

Table 4. Essential elements for plants.

Macronutrients			Micronutrients		
Element	Atomic Symbol	Plant Available Form	Element	Atomic Symbol	Plant Available Form
carbon	C	CO_2	iron	Fe	Fe^{2+}, Fe^{3+}
hydrogen	H	H^+	manganese	Mn	Mn^{2+}
oxygen	O	O_2, H_2O	boron	B	H_3BO_3
nitrogen	M	NH_4^+, NO_3^-	zinc	Zn	Zn^{2+}
phosphorus	P	$H_2PO_4^-$, HPO_4^{2-}	copper	Cu	Cu^{2+}
potassium	K	K^+	chlorine	Cl	Cl^-
calcium	Ca	Ca^{2+}	cobalt	Co	Co^{2+}
magnesium	Mg	Mg^{2+}	molybdenum	Mo	MoO_4^{2-}
sulfur	S	SO_4^{2-}	nickel	Ni	Ni^{2+}

In addition to the 18 elements required by plants, animals also require arsenic (As), chromium (Cr), fluorine (F), iodine (I), lithium (Li), sodium (Na), selenium (Se), silicon (Si), and tin (Sn). Herbivorous animals obtain these elements by eating plants, which take up the elements, even though the plant might not need them. Carnivorous animals, in turn, obtain the elements by preying on other animals.

Regardless of whether the elements are required by plants or animals, all except carbon, hydrogen, oxygen, and nitrogen, are made available initially by weathering of minerals. The elements gradually become concentrated in the biosphere through biogeochemical cycles, including the carbon and nitrogen cycles, which will be covered in a later laboratory.

ROCKS

The most common rocks are consolidated assemblages of minerals, but a few (e.g., obsidian, pumice, and coal) comprise non-crystalline (hence, nonmineral) materials. Despite the great number of possible compositions and arrangements, rocks can be divided into three categories based on their mode of formation: igneous, sedimentary, and metamorphic.

Igneous Rocks

Intrusive and Extrusive: Igneous rocks form when molten material called magma cools and solidifies.

Although the magma originates tens of kilometers below Earth's surface, it can solidify at any depth from its depth of origin to the surface. Magma that remains at depth while cooling and solidifying forms igneous intrusive rocks. Because of extremely slow cooling, minerals can grow to macroscopic size, and can be readily identified in a hand specimen.

Instead of remaining deep throughout the cooling process, some magmas erupt to the surface, where they cool and solidify rapidly. The resulting igneous extrusive rocks can be glassy (i.e., amorphous) or microcrystalline, although many contain a smattering of macrocrystals that formed before eruption. In erupting, the magma might ooze toward the surface as lava, or it might explode violently into the atmosphere, forming pumice and volcanic ash.

Felsic and Mafic: In addition to having distinctively different crystal sizes, igneous rocks also vary in mineralogical composition because of chemical differences among magmas. Some rocks are dominated by quartz and orthoclase (potassium-rich feldspar) because they derived from magma that was rich in silica and potassium. These rocks, which tend to be light colored, are called felsic. Other igneous rocks have little or no quartz or orthoclase, but instead are characterized by calcic plagioclase (calcium-rich feldspar) and ferromagnesian minerals (e.g., augite and hornblende). These are called mafic and are dark colored. Other rocks of intermediate compositions can be found between these extremes.

Classification of Igneous Rocks

The textural trend caused by varying rates of cooling, combined with the mineralogical trend resulting from chemical differences in magma provide the basis for classifying igneous rocks (Table 5). Selected elements also combine to form minerals, which then combine to form a common igneous intrusive rock (Table 6).

Accessory minerals, which can be significant, also vary from felsic to mafic. Of the micas, muscovite is felsic, and biotite is more mafic. As a result, muscovite is found in felsic rocks, including true granite, whereas biotite can occur in rocks ranging from felsic to moderately mafic. An important rock of intermediate composition is granodiorite, which has a characteristic salt-and-pepper appearance derived from light colored quartz and feldspars, especially sodic plagioclase, combined with dark colored biotite. Olivine, a strongly mafic mineral, and augite, which is slightly less mafic, are common constituents of gabbro and basalt.

Table 5. Classification of igneous rocks

	Silica - SiO_2		
	Mg - magnesium and Fe - iron		
	K-feldspar (orthoclase)	Na-feldspar (plagioclase)	Ca-feldspar (plagioclase)
	Felsic	Intermediate	Mafic
Intrusive (macrocrystalline)	**granite**	**granodiorite**	**gabbro**
	other rocks of intermediate composition		
Extrusive (microcrystalline)	**rhyolite**		**basalt**

Table 6. An example of elements combining to form minerals and minerals combining to form an igneous rock.

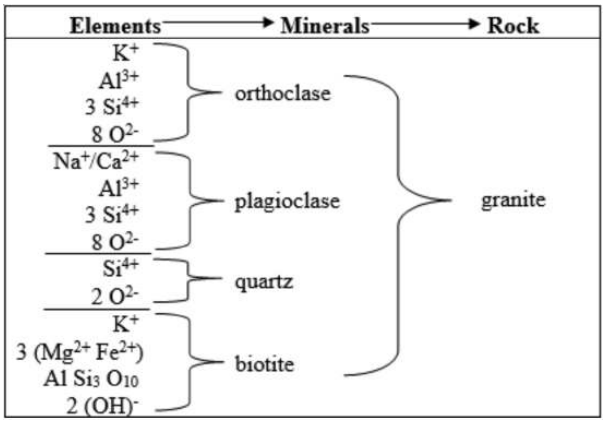

Sedimentary Rocks

Sedimentary rocks, which make up the bulk of Earth's continental crust, can be either clastic (i.e., fragmental) or nonclastic (i.e., nonfragmental). See Table 7 for examples.

Clastic rock: consist of fragments of previously existing rocks (igneous, sedimentary, or metamorphic) that have been transported to a new location (often an ocean bottom), where they were deposited and buried layer upon layer, and cemented together. The deposits can be several thousand meters thick!

The fragments, or clasts, can vary in size to include clay, silt, sand, gravel, and cobbles.

Nonclastic rock: form by chemical precipitation of dissolved salts and by biochemical precipitation of organically derived compounds in water, most commonly on the floors of shallow seas. Organisms that generate nonclastic rocks include bacteria, algae, diatoms, corals, and mollusks. The most common nonclastic sedimentary rocks are limestone and dolomite (also called dolomitic limestone). Others include rock gypsum, chert, and coal.

Although the two major categories are recognized, most sedimentary rocks are a combination of clastic and nonclastic, nonetheless they usually are dominantly one or the other. For example, the sand grains in sandstone are clastic, but the cement that holds them together can be nonclastic.

Table 7. Classification of sedimentary rocks.

Clastic		**Nonclastic**	
Dominant Constituent	**Sedimentary Rock**	**Dominant Constituent**	**Sedimentary Rock**
clay	claystone	calcite ($CaCO_3$)	limestone
silt	siltstone	dolomite $(CaMg)(CO_3)_2$	dolomite
mud (silt + clay)	mudstone	gypsum ($CaSO_4 \cdot 2H_2O$)	gypsum
thinly layered mud	shale	microcrystalline quartz (SiO_2)	chert
sand (≥ 50%): mostly quartz, feldspars, micas sand: 50-85% sand with remainder mud and possibly some pebbles sand: > 85% sand with remainder mud and possibly pebbles	sandstones wacke (dirty sandstone) arenite (clean sandstone)		
gravel (pebbles) with sand and mud; quartz, orthoclase, quartzite	conglomerate		

Metamorphic Rocks

Metamorphic rocks form primarily by the application of extremely high heat and pressure to some previously existing rock. The original rock may be igneous, sedimentary, or even metamorphic, but sedimentary rocks are most susceptible to metamorphosis. Metamorphic rocks can be either foliated or nonfoliated. Foliated rocks consist of minerals that are aligned or oriented to yield a somewhat stratified or layered appearance, whereas the minerals in nonfoliated rocks are about equally arranged in all directions, giving them a more uniformly massive appearance (Table 8).

Table 8. Classification of metamorphic rocks.

Foliated		
Metamorphic Rock	*Common Original Rock*	*Appearance/Comments*
slate	shale	strongly stratified (layered), flat; often with very fine quartz and mica; cleaves into sheets, but denser than shale
schist	shale or other slate	wavy foliation; often with micas, quartz, feldspars
gneiss (pronounced “nice”)	granitic rocks	minerals oriented to give more faint stratification than schist; often contains the same minerals as its granitic counterpart
Nonfoliated		
marble	limestone	calcite cleavage usually visible; fizzes to release CO2 when tested with HCl
quartzite	quartz arenite	hard; very resistant to weathering
serpentinite	peridotite (an ultramafic igneous rock)	greenish assemblage of serpentine minerals; high magnesium; occurs intermittently along west coast of North America, and smaller areas of the East Coast

WEATHERING

Weathering breaks rocks and minerals down, resulting in the production of soils. Weathering occurs via two processes: physical disintegration (breaking into smaller pieces) and chemical decomposition (changing the nature of the minerals themselves).

Physical disintegration causes rock masses to split apart or to abrade and wear away from the larger rock surface. Freezing and thawing, abrasion by particles suspended in wind or water, and grinding caused by glaciers result in disintegration. Repeated actions of these processes cause stresses, which eventually break and erode rock surfaces. Physical weathering usually precedes or occurs in concert with the chemical decomposition process. With a decrease in the size of individual particles, the total number of corners and edges and the total surface area of the rock mass greatly increase.

Chemical decomposition

Chemical decomposition progresses most rapidly when more surface area is available for chemical reactions to occur. Warm and wet environments enhance chemical decomposition. The smaller the particles, the greater the surface area of a given volume of rock (the greater the total exposed corners and edges) and the greater the rate of chemical decomposition. The total number of corners exposed to weathering processes is the major factor in the determination of weathering rates. This is because a corner has three surfaces and three edges for chemical attack. Chemical weathering is a combination of five major processes: carbonation, hydration, hydrolysis, oxidation-reduction (redox), and solution.

Hydrolysis and particle size: Hydrolysis is a chemical decomposition process involving the splitting of water molecules during a reaction. A hydrolysis reaction can be easily identified by looking for water on the left side of a chemical equation and the absence of water (but the formation of H^+ and/or OH^-) on the right side of the equation. All minerals weather by hydrolysis. The hydrolysis reaction is particularly evident with silicate minerals (e. g. feldspars and micas). Hydrolysis is the primary reaction resulting in the release of most plant nutrient elements from minerals. The mineral orthoclase will weather by hydrolysis.

$$\mathrm{KAlSi_3O_8 + H_2O \rightarrow HAlSi_3O8 + K^+ + OH^-}$$

Orthoclase + Water → Al-silicate mineral + Potassium ion + Hydroxide ion

The potassium cation (K^+) released by this hydrolysis reaction is soluble in water and can be adsorbed by the soil clay minerals and organic colloids, used by plants, or be removed (leached) by the drainage water. The aluminum silicate compound may crystallize

into a clay mineral (e. g. kaolinite). This natural chemical weathering process occurs at a very slow but continual rate in all rocks, parent materials, and soils. The smaller the original mineral, the faster the hydrolysis reaction will occur. The hydroxide ion (OH^-) will increase the pH. When a glacier grinds rocks with glacial ice (water), the grinding is a physical disintegration process. However, the resulting hydrolysis reaction of the fine particles hydrolyzing with the water causes the glacial till to have a high pH (abrasion pH). Initially, the pH of the glacial till will be 9 or 10, but as the glacial till absorbs carbon dioxide from the air, the pH will drop.

Carbonation and Solution: The metabolic activities of plant roots and microorganisms produce an abundance of CO_2 within soil pores. This CO_2 reacts with soil water to produce most of the carbonic acid found in soils.

$$CO_2 + H_2O \leftrightarrow H_2CO_3$$

Carbon Dioxide + Water ↔ Carbonic acid

The carbonic acid in the soil water continually reacts with minerals as the water percolates through soils and rocks. Carbonic acid, a weak acid, is the most common acid found in soils. Carbonic acid can ionize into acidic hydrogen ions (H^+) and bicarbonate (HCO_3^-):

$$H_2CO_3 \leftrightarrow H^+ + HCO_3$$

Carbonic acid ↔ Acidic hydrogen ion + Bicarbonate ion

At pH < 6, this reaction tends to go more to the left than to the right, indicating carbonic acid is a weak acid and does not produce very many acidic hydrogen ions. Carbonic acid is effective in accelerating the chemical decomposition processes of minerals because nature continually provides rainwater and carbon dioxide. Thus, rainwater drives this reaction to the right. As the rainwater moves through the soil, it carries soluble bicarbonate ions deeper into the soil profile and deposits the acidic hydrogen ions on the soil surfaces. The law of mass action allows the soil to eventually become acidic with time of weathering as rainfall drives the above reaction to the right.

As a result of a glacier grinding rocks, the hydrolysis reaction results in the glacial till containing soluble Ca2+ ions and OH- ions (which causes a high pH, greater than 8.3). As the glacial till is exposed to carbonic acid, the glacial till undergoes two carbonation reactions. The first reaction process is quite rapid, while the second reaction is slow and requires time for completion. The first carbonation reaction is

$$Ca^{2+} + 2OH^- + H_2CO^3 \rightarrow CaCO_3 + 2H_2O$$

Soluble calcium + Soluble hydroxide + Carbonic acid → Low soluble calcite + Water

The second reaction is:

$$CaCO_3 + H_2CO_3 \rightarrow Ca(HCO_3)_2$$

Calcite + Carbonic acid → Soluble calcium bicarbonate

The calcium bicarbonate dissolves slowly and releases soluble calcium ions (Ca^{2+}) for plant uptake or possible leaching downward through the soil when excessive rainfall or irrigation occurs. The loss of the calcite minerals (the chief mineral in limestone) eventually leads to the development of acidic soils, carbonate hardpans, and the formation of huge underground caverns (e. g. Mammoth Cave and Carlsbad Caverns). The cave one walks through is the hole remaining after the soluble calcium bicarbonate has left the cavity where the carbonic acid dissolved the limestone rock.

The soluble calcium and bicarbonate move downward and enter the ground water, which eventually emerges as water in streams flowing to the ocean. The presence of the calcium bicarbonate in the ground water is the major reason limestone ground water is termed “hard water”.

Eventually, the second reaction has two major effects in a high rainfall environment. First, the surface soil will become acidic and the pH will decrease due to increased rainfall and CO_2 production (H_2CO_3). Second, soluble calcium is made available to plants. However, further rainfall will leach the soluble calcium bicarbonate downward.

Eventually, the soil will become depleted of calcium (Ca^{2+}). The same phenomenon will be true for magnesium (Mg^{2+}), potassium (K^+), and sodium (Na^+) cations released to the soil by the hydrolysis of various minerals. This process results in a loss of overall

plant nutrition and soil fertility.

Reduction-oxidation (redox) reactions: involve the transfer of electrons from one reactant to another. In every redox reaction, some substance becomes oxidized and some other substance becomes reduced by the transfer of the electron. The substance losing the electron is oxidized and the component accepting the electrons becomes reduced. Commonly, but not always, oxygen serves as the oxidizing agent.

Oxygen combines with an element in a mineral, such as iron (Fe^{2+}), causing the iron to give up some of its electrons, which are accepted by oxygen. The iron becomes oxidized while the oxygen becomes reduced. These electron transfers constitute a form of chemical weathering, which disrupts the mineral's atomic structure, releasing several elements, and leading to the development of new compounds including clay minerals.

Although redox reactions take place continuously in soils, their reaction rates can be very slow and unnoticeable. If a soil is moist and well aerated, iron tends to become oxidized (Fe^{3+}, loses electrons to oxygen), but if air (oxygen gas) is absent, as occurs with water-saturated soil, the iron becomes reduced (Fe^{2+}, gains electrons). The extent of either oxidation or reduction in soils is manifested in the color of the soil. Oxidized iron (Fe^{3+}) occurs where oxygen is present in well-drained soils and produces red, yellow, or brown colors in soils. Reduced iron (Fe^{2+}) exists in flooded or very poorly drained soils and produces black, gray, olive, and blue colors. Alternating periods of oxidation and reduction, caused by fluctuating water levels in a soil, result in mottling (blotches of red and yellow mixed with gray colors) to occur. Continuous strongly reducing conditions caused by long-term water-logging forms gleyed conditions. Gleyed soils have dark gray to blue to black soil colors.

$$Fe^{2+}\xleftrightarrow{}O_2Fe^{3+}$$

Reduced (gray soil colors) ↔ Oxidized (red and yellow soil colors)

Read through and complete the folowing activity and questions. All questions should be answered and completed labs are due at the end of the laboratory period. No late work wil be accepted.

This page titled 2.1: Introduction is shared under a CC BY 4.0 license and was authored, remixed, and/or curated by Anna R. Schwyter & Karen L. Vaughan (UW Open Education Resources (OER)) via source content that was edited to the style and standards of the LibreTexts platform.

2.2: Activity 2 - Minerals

You will need to study the mineral specimens provided to fill in the blanks in the table below. Use the following guidelines for completing the table:

- **Color**: Describe what you see. Munsell color designations are not necessary.
- **Luster**: Write in either “M” for metallic or “N” for nonmetallic.
- **Hardness**: Soft (S) minerals can be scratched by a fingernail. Medium (M) minerals can be scratched by a penny. Hard (H) minerals cannot be scratched by a penny and can scratch glass.
- **Cleavage**: Note whether present (1, 2, or 3 directions) or absent (0 directions).
- **Plant-available nutrients**: Refer to the list of essential elements and to Tables 3 and 4. Write in the chemical symbol of nutrients that are released and used by plants by weathering of minerals.

Table 3

Mineral	Color	Luster (M or N)	Hardness (S, M, or H)	Cleavage (yes/no)	Plant-available nutrients from Minerals (Table 4) (atomic symbol & charge)
pyrite					
calcite					
gypsum					
hornblende					
muscovite					
plagioclase					
orthoclase					
quartz					

1) Which of the minerals in Table 3 is most resistant to weathering?

2) Of the eight most common elements in the earth’s crust, which ones are essential elements that are released to plants by the weathering of minerals?

_____ _____ _____ _____

3) Name the source of each of the following plant-essential elements:

C _____

H _____

O _____

N _____

This page titled 2.2: Activity 2 - Minerals is shared under a CC BY 4.0 license and was authored, remixed, and/or curated by Anna R. Schwyter & Karen L. Vaughan (UW Open Education Resources (OER)) via source content that was edited to the style and standards of the LibreTexts platform.

2.3: Activity 2 - Rocks

Read the background information presented in this exercise, and study the minerals and rocks provided to fill in the blanks in the Properties of Rocks Table. Give the class as igneous intrusive (Ii), igneous extrusive (Ie), sedimentary (S), or metamorphic (M). List the crystal or grain size as microscopic (Mi) if the crystals or grains are too small to identify without a microscope, or macroscopic (Ma) if the crystals or grains are recognizable without a microscope.

Exercise: Fill in the properties of the following rocks provided in the rock and mineral kits.

Ii=igneous intrusive, Ie=Igneous extrusive, S=sedimentary, M=Metamorphic, Mi=microcrystalline, Ma=macrocrystalline.

Rock	**Class (Ii, Ie, S, M)**	**Color**	**Crystal or grain size (Mi, Ma)**	**Principal Constituents or Minerals**
granite				
basalt				
sandstone				
schist				
limestone				
chert				
conglomerate				
marble				
gneiss				
shale				

This page titled 2.3: Activity 2 - Rocks is shared under a CC BY 4.0 license and was authored, remixed, and/or curated by Anna R. Schwyter & Karen L. Vaughan (UW Open Education Resources (OER)) via source content that was edited to the style and standards of the LibreTexts platform.

2.4: Activity 3 - Weathering

Part 1

Your instructor has set up 2 beakers on a laboratory bench. Each beaker has a rock immersed in some type of liquid. Beaker #1 is filled with soda water, while beaker #2 contains a soil ped. Record the pH of the soda water, then submerge the ped into the soda water beaker. After the reaction has subsided, measure the pH of the solution. Record initial and final pH of the solution.

Initial pH: _____

Final pH: _____

1. *What are your predictions for what will happen when the liquids are added?*
2. *List your observations:*
3. *Explain the chemical process you observed:*

Part 2

Your instructor has set out pictures detailing redoximorphic features displaying Oxidation and Reduction reactions. Observe each photo and detail your observations in the section below.

1. *Observe the picture on display for gleyed soils (Image 1). Describe the appearance of the gleyed soil.*
2. *Observe the colors of the mottled soil on display (Image 2). Describe the appearance of the mottled soil.*
3. *What are the physical (i.e. color) and chemical (i.e. form of Fe) properties of a gleyed/reduced soil?*
4. *What environmental condition causes soils to become gleyed?*
5. *In the field, what soil topographic or slope position (i.e. summit, backslope, or toeslope) would be most conducive to the formation of reducing conditions or gleyed soils? Why?*
6. *Most soils do NOT have gleyed horizons. If a gleyed horizon exists, which soil horizon is most commonly gleyed/reduced in a soil (Assume this soil has an impermeable layer at 100 cm)?*
7. *Explain why this horizon (from Q #6) would be most commonly reduced or gleyed.*
8. *Soil may have a mottled condition associated with a fluctuating water table. What are the physical and chemical properties of a mottled soil? What happens when the water table rises and falls in the mottled soil zone?*
9. *Well oxidized soils are associated with what soil drainage condition? (See page 1-11 in the Red Book)*
    - *In the field, what soil topographic or slope position (i.e. summit, backslope, or toeslope) would be most conducive to the formation of strongly oxidizing conditions in a soil? Why?*
10. *For most soils, which is likely to have the most oxides, and most likely to have an oxidized horizon? Why?*

This page titled 2.4: Activity 3 - Weathering is shared under a CC BY 4.0 license and was authored, remixed, and/or curated by Anna R. Schwyter & Karen L. Vaughan (UW Open Education Resources (OER)) via source content that was edited to the style and standards of the LibreTexts platform.

2.5: Activity 4- Rocks to Parent Material

Development of rocks into parent material that becomes soil

As mentioned above, inorganic parent materials are typically derived from a variety of geological species. These parent materials are typically identified by their mode of transportation (i.e. colluvium transported by gravity, or loess transported by wind), however, it is important to recognize how specific rock types physically weather in order to be able to identify parent materials properly in the field.

Observe the trays of parent materials and soil for the granite and sandstone rocks on display. The first tray contains the fresh rocks before being weathered, the second tray contains the parent material of the soil formed from this rock, and the third tray contains the soil formed from the parent material derived from this rock type.

1) List the main minerals in each type of rock.

Granite:

Sandstone:

2) What main physical changes (particle size and color) have occurred in the stages from rock to weathered rock to soil?

3) Which fraction—rock, weathered rock, or soil (circle one)—is most susceptible to further physical and chemical weathering? Why?

4) You will drop some hydrochloric acid (HCl) (a few drops) on each fraction (rock, weathered rock, and soil). Indicate which materials fizz by filling in the table below with a “Y” for yes and an “N” for no.

Rock Type	Rock (R)	Weathered rock parent material (Cr)	Soil
Granite			
Sandstone			

5) What is the reason (which reaction is responsible) for the fizzing?

REMINDERS/Assignments for next week’s lab:

a) Study for pre-lab Quiz on material from Lab #3: Soil Taxonomy.

b) Complete pre-class activity: classified location exercise (Lab 3) c) Next week we will prep bulk density samples for an upcoming lab on Soil Physical Properties.

c) Next week we will prep bulk density samples for an upcoming lab on Soil Physical Properties.

This page titled 2.5: Activity 4- Rocks to Parent Material is shared under a CC BY 4.0 license and was authored, remixed, and/or curated by Anna R. Schwyter & Karen L. Vaughan (UW Open Education Resources (OER)) via source content that was edited to the style and standards of the LibreTexts platform.

CHAPTER OVERVIEW

3: Soil Taxonomy

Learning Objectives

- To be able to identify epipedons and endopedons
- To become familiar with the 12 soil orders
- To understand the structure of Soil Taxonomy
- To begin to understand some of the broader applications and importance of Soil Taxonomy and classification of soils

GOAL: To understand the main soil factors that contribute to the classification of a soil and how to use the system of Soil Taxonomy.

3.1: Introduction to Soil Taxonomy

3.2: Pre-Class Activity- Classified Location Exercise

3.3: Activity 1- Horizons and Characteristics

3.4: Activity 2 - Taxonomic Class

Additional resources:

- The University of Idaho, “Twelve soil orders” - https://www.uidaho.edu/cals/soil-orders
- USDA-NRCS link to download the FREE .pdf of “Keys to Soil Taxonomy”-
- https://www.nrcs.usda.gov/wps/portal/nrcs/detail/soils/survey/class/?cid=nrcs142p2_053580
- This lab adapted from Moorberg, Colby J. and Crouse, David A., "Soils Laboratory Manual, K-State Edition" (2017). NPP eBooks. 15. https://newprairiepress.org/ebooks/15 licensed under CC by 4.0

This page titled 3: Soil Taxonomy is shared under a CC BY 4.0 license and was authored, remixed, and/or curated by Anna R. Schwyter & Karen L. Vaughan (UW Open Education Resources (OER)) via source content that was edited to the style and standards of the LibreTexts platform.

3.1: Introduction to Soil Taxonomy

The word, “taxonomy” is based on the Greek words “taxis”, meaning arrangement; and “nomia”, meaning method. In biology, taxonomy refers to a hierarchical system in which organisms are grouped based on shared characteristics, with domains and kingdoms at the top of the hierarchy, and genus and species at the lowest levels. Similarly, Soil Taxonomy is a hierarchical system used to group soils based on observable or measurable characteristics. A common application of soil classification (the act of identifying the taxonomic classification for a given soil) is to develop models of how soils of different classifications associate with one another within a landscape, which can eventually be used in soil mapping. The primary concepts of soil classification using Soil Taxonomy will be reviewed in this lab, followed by an overview of the Web Soil Survey (United States Department of Agriculture Natural Resources Conservation Service, 2016).

Table 1. “Explanation of the Ap horizon description” by Colby J. Moorberg and David A. Crouse is licensed under CC by 4.0

Morphological property	Description	Morphological property	Description
Horizon designation	Ap	Structure grade	Moderate
Upper depth	0 in	Structure size	Medium
Lower depth	9 in	Structure type (shape)	Granular
Color name	Dark grayish brown	Moist consistence	very friable
Munsell hue	10YR	Roots	Many fine roots
Munsell value	4	pH	Slightly acid
Munsell chroma	2	Boundary	clear smooth
Textural class	Silt loam		

Completing a soil profile description involves a systematic approach:

- Observing the landscape setting.
- Examining the morphological features like texture, structure, color, consistence, etc. of the soil to distinguish any layers or horizons.
- Describing in detail the texture, structure, color, consistence, and other features of each horizon.
- Assigning horizon designations to each layer.
- *Classifying the soil on the basis of its morphology and horizonation.*

THE TAXONOMICAL SYSTEM OF SOIL

A comprehensive classification system is important for any science: soil science, plant science, biology, geology, among many others. Effective taxonomy allows us to organize knowledge and learn new relationships. Soil Taxonomy helps in extrapolating soil management research among similar soils around the world. Soil Taxonomy is a quantitative system based on soil properties that can be observed or measured, organized in a hierarchy based on six categories beginning with 12 broad soil orders and narrowing in specificity to more than 23,000 series. The organization of a taxonomic name by category is illustrated in Figure 1.

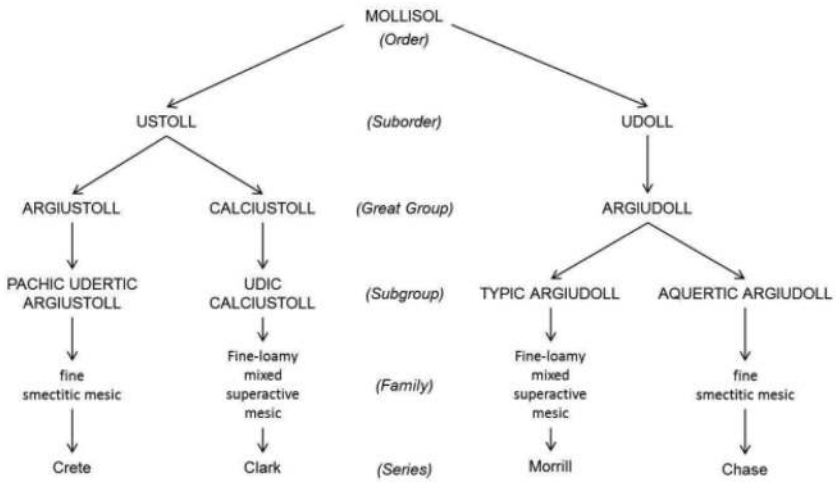

Figure 1. "Organization of Soil Taxonomy with examples" by Colby J. Moorberg and David A. Crouse is licensed under CC by 4.0

IDENTIFICATION OF THE TAXONOMIC CLASS OF A SOIL

Classification of soils is determined using the systematic approach outlined in the *Keys to Soil Taxonomy*. Individuals must begin with the "Key to Soil Orders" and eliminate, one by one, the classes including criteria which do not meet the soil in question. Whichever order's criteria aligns best with the soil in question first will be the soil order selected. This process is used for all subsequent categories in the ordering of order, suborder, great group, and subgroup. Family and Series are determined by other individual methods using criteria outlined in the *Keys to Soil Taxonomy* (2014).

Order

There are 12 soil orders in total (Table 4). The geographical range of each order is dependent upon several environmental processes and climatic factors (i.e. temperature, precipitation, etc.) leading to soil formation. Soil order is the first to be determined when classifying a soil.

Table 4. "Simplified key to the 12 soil orders" by Colby J. Moorberg and David A. Crouse is licensed under CC by 4.0 The bolded syllable in each order is the formative element used in the names of suborders and lower taxonomic levels.

Order	Major Diagnostic Features
Gelisols	Soils with permafrost or gelic material within 100 cm
Histosols	Other soils with >30% organic matter (>12% organic carbon) content to a depth of 40 cm or more
Spodosols	Other soils with a spodic horizon (illuvial humus, iron) within a depth of 200 cm
Andisols	Other soils with andic soil properties (low density, volcanic glass, pumice, etc.) in ≥50% of the upper 60 cm
Oxisols	Other soils with an oxic horizon, or containing more than 40% clay in the surface 18 cm and a kandic horizon with less than 10% weatherable minerals (highly weathered)
Vertisols	Other soils containing more than 30% clay in all horizons and cracks that open and close periodically (shrinking/swelling)
Aridisols	Other soils with some diagnostic subsoil horizon(s) and an aridic soil moisture regime
Ultisols	Other soils with an argillic or kandic horizon and a base saturation at pH 8.2 of <35% at a depth of 180 cm
Mollisols	Other soils with a Mollic epipedon and a base saturation at pH 7 of ≥50% in all depths above 180 cm
Alfisols	Other soils with an argillic, kandic, or natric horizon (and a base saturation at pH 8.2 of >35% at a depth of 180 cm)
Inceptisols	Other soils with an umbric, mollic, or plaggen epipedon or a cambic horizon
Entisols	Other soils

Suborder

Soil suborders are determined based on soil moisture regimes and diagnostic features. Formative elements specify unique soil properties at each taxonomic level and has a connotation for a given soil.

The formative elements for suborder are listed in, (Table 5).

Table 5. "Formative elements used to identify various suborders in Soil Taxonomy" by Colby J. Moorberg and David A. Crouse is licensed under CC by 4.0

Formative element	Connotation	Formative element	Connotation
alb	Presence of albic horizon (a bleached eluvial horizon)	hist	Presence of histic epipedon
anthr	Presence of anthropic or plaggen epipedon	hum	Presence of organic matter
aqu	Characteristics associated with wetness	orth	The common ones
ar	Mixed horizons	per	Of year-round humid climates, perudic moisture regime
arg	Presence of argillic horizon (a horizon with illuvial clay)	psamm	Sand textures
calc	Presence of calcic horizon	rend	Rendzinalike-high in carbonates
camb	Presence of cambric horizon	sal	Presence of salic (saline) horizon
cry	Cold	sapr	Most decomposed stage
dur	Presence of a duripan	torr	Usually dry
fibr	Least decomposed stage	turb	Cryoturbation
fluv	Floodplains	ud	Of humid climates
fol	Mass of leaves	ust	Of dry climates, usually hot in summer
gyps	Presence of gypsic horizon	vitr	Resembling glass
hem	Intermediate stage of decomposition	xer	Dry summers, moist winters

Great group

The great group expresses the degree of diagnostic horizon expression within each suborder taxa. The formative elements for great group are listed in (Table 6).

Table 6. "Formative elements for names of great groups and their connotations" by Colby J. Moorberg and David A. Crouse is licensed under CC by 4.0

Formative element	Connotation	Formative element	Connotation
acr	Extreme weathering	hist	Presence of organic materials
aer	Chroma >2, non-reducing	fragi	Fragipan
agr	Agric horizon	hum	Humus
al	High aluminum, low iron	hydr	Water
alb	Albic horizon	kand	Low-activity 1:1 silicate clay
and	Ando-like	lithic	Near stone
anhy	Anhydrous	luv, lu	Illuvial
aqu	Water saturated	melan	Melanic epipedon
aren	Sandy	molli	With a mollic epipedon
argi	Argillic horizon	natr	Presence of a natric horizon
calc, calci	Calcic horizon	pale	Old development
camb	Cambic horizon	petr	Cemented horizon
chrom	High chroma	plac	Thin pan
cry	Cold	plagg	Plaggen horizon
dur	Duripan	plinth	Plinthite
dystr, dys	Low base saturation	psamm	Sand texture
endo	Fully water saturated	quartz, quartzi	High quartz
epi	Perched water table	rhod	Dark red colors
eutr	High base saturation	sal	Salic horizon
ferr	Iron	sapr	Most decomposed
fibr	Least decomposed	somb	Dark horizon
fluv	Floodplain	sphagn	Sphagnum moss
fol	Mass of leaves	sulf	Sulfur
fragloss	See frag and gloss	torr	Usually dry and hot
fulv	light-colored melanic horizon	ud	Humid climates
gyps	Gypsic horizon	umbr	Umbric epipedon
gloss	Tongued	ust	Dry climate, usually hot in summer
hal	Salty	verm	Wormy, or mixed by animals
hapl	Minimum horizon	vitr	Glass
hem	Intermediate decomposition	xer	Dry summers, moist winters

Subgroup

A soil's subgroup is defined by properties that are transitional or similar to those found in other orders, suborders, and great groups.

Family

The family is typically comprised of more than one component that is determined for the soil in question using information detailed in chapter 17 of the *Keys to Soil taxonomy*. The technical family name is comprised of descriptive terms for family information such as, particle size class and mineralogy of control section, soil temperature regime, CEC, depth, rupture-resistance, etc.

Complete taxonomical name

After each category is subsequently determined by the systematical methods of the Keys to Soil Taxonomy, a complete taxonomic name is the end result (Figure2). A complete taxonomic name communicates a great deal of information about the soil if we understand each part of the name (Table 8).

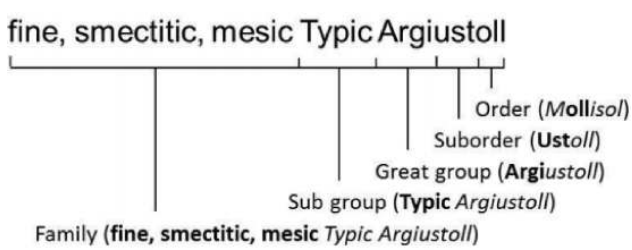

Figure 2. "Formative elements in the taxonomic classification of the Harney series" by Colby J. Moorberg and David A. Crouse is licensed under CC by 4.0

Table 8. "Translation of the taxonomic classification of the Harney Series" by Colby J. Moorberg and David A. Crouse is licensed under CC by 4.0

Categories	Properties connoted
ORDER: Mollisol	Has a mollic epipedon and a base saturation of >50% to a depth of 1.8 m from the soil surface or to an impermeable layer
SUBORDER: Ustoll	has an ustic moisture regime; dry for as long as 90 days cumulatively per year
GREAT GROUP: Argiustoll	has an argillic horizon
SUBGROUP: Typic Argiustoll	typical of an Argiustoll, not intergrading toward another great group condition
FAMILY: fine, smectitic, mesic	the upper 50 cm of the argillic horizon has 35-60% clay; the dominant clay minerals are smectite minerals (montmorillonite, beidellite, and nontronite); the mean annual soil temperature at 50 cm is 8°C to 15°C (47°F to 59°F)
SERIES: Harney	differs from soils in the same family in based on color, parent material (loess), and calcium accumulation below 28 in.

This page titled 3.1: Introduction to Soil Taxonomy is shared under a CC BY 4.0 license and was authored, remixed, and/or curated by Anna R. Schwyter & Karen L. Vaughan (UW Open Education Resources (OER)) via source content that was edited to the style and standards of the LibreTexts platform.

3.2: Pre-Class Activity- Classified Location Exercise

Name: _____

Section: _____

Student ID#:_____

To help familiarize ourselves with some basics of Soil Taxonomy we will parallel some of the unfamiliar concepts of the taxonomical system of soil with the familiar concepts of where you are from, or another special place of your choice! So let's take this step by step…

To begin, this is what a classified soil looks like in text:

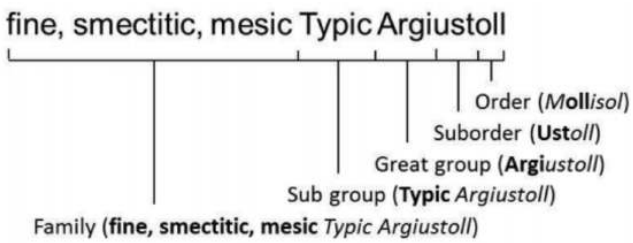

To break things down, each soil taxonomical category is described in general detail below, outlining what information contributes to each of the categories:

Taxonomical category	Description of defining/diagnostic information	Example
Order	One of the 12 soil orders*	Alfisol, Gelisol, Oxisol
Suborder	Soil moisture regimes and diagnostic horizons	**Aqu**alf- **Wet** Alfisol **Fluv**ent- Entisol **on floodplain**
Great group	Degree of diagnostic horizon expression within each suborder taxa	**Cry**aqualfs- **cold**, wet, Alfisol **Fragi**aqualfs- **have fragipans** and are wet Alfisols
Subgroup	Properties that are transitional or similar to those found in other orders, suborders, and great groups	**Humic** Fragiaualfs- **presence of organic matter** in a wet Alfisol with fragipan
Family	Particle size class and mineralogy of the control section, soil temperature regime, CEC, depth, rupturesistance, etc.	**Fine, smectic, mesic** **Mixed, mesic**
Series	Any consistently identifiable soil property not specifically identified as criteria in a higher category	**Forkwood** **Narragansett** **Hoosic**

*The 12 Soil Orders: (Alfisol, Andisol, Aridisol, Entisol, Gelisol, Histosol, Inceptisol, Mollisol, Oxisol, Spodosol, Ultisol, Vertisol)

Now, let's relate similar taxonomical concepts to information and details regarding your hometown, or favorite place…

ORDER:

Order is the broadest of the categories, while still providing a sense of overall identity. Please select one of the following states or territories that is most applicable to the location of your hometown/favorite place. If located outside the US, please note it as, “OUS” (outside U.S.). Your classification text should be as follows: _____, _____, _____, _____ ____ ____ HI

Alabama - AL	New Mexico - NM
Alaska - AK	New York - NY
Arizona - AZ	North Carolina - NC
Arkansas - AR	North Dakota - ND
California - CA	Ohio - OH
Colorado - CO	Oklahoma - OK
Connecticut - CT	Oregon - OR
Delaware - DE	Pennsylvania - PA
Florida - FL	Rhode Island - RI
Georgia - GA	South Carolina - SC
Hawaii - HI	South Dakota - SD
Idaho - ID	Tennessee - TN
Illinois - IL	Texas - TX
Indiana - IN	Utah - UT
Iowa - IA	Vermont - VT
Kansas - KS	Virginia - VA
Kentucky - KY	Washington - WA
Louisiana - LA	West Virginia - WV
Maine - ME	Wisconsin - WI
Maryland - MD	Wyoming - WY
Massachusetts - MA	American Samoa - AS
Michigan - MI	District of Columbia - DC
Minnesota - MN	Federated States of Micronesia - FM
Mississippi - MS	Guam - GU
Missouri - MO	Marshall Islands - MH
Montana - MT	Northern Mariana Islands - MP
Nebraska - NE	Palau - PW
Nevada - NV	Puerto Rico - PR
New Hampshire - NH	Virgin Islands - VI
New Jersey - NJ	

Suborder:

This describes one of the most defining characteristics of your hometown, whether that be proximity to the coast, overall moisture conditions, elevation, etc. For example, : If I live in Hawaii, my most defining feature is that I live on an Island, so I will designate this as…

_____, _____, _____, _____ ___ islhi

isl= on an island, hi= in Hawaii

Please select one of the following below that best describes your location:

Anthr- located in a city with a lot of human activity and impact	**Hi**- located at an elevation higher than 5K ft
Aqu- impacted by a lot of rain	**Inl**- located inland
Coas- located on or near the coast (~15 mi)	**Isl**- located on an island
Cry- cold most of the year	**Lo**- located at an elevation lower than 1K ft
Des- located in the desert	**Sno**- impacted by a lot of snow
Dry- dry land conditions	**Riv**- located near a prominent river or freshwater body
For- live in a forest	**War**- warm/hot most of the year
Emp- vast lands	

Great group:

This describes your location further in depth, almost like an adjective to describe the prominent feature of your locale. For example: If I live in Hawaii, I will first say I live on an Island, and on this Island I live extremely close to the coast (<15 mi), so I will designate this as…

_____, _____, _____, _____ Coasislhi

Coas = on the coast, isl= on an island, hi= in Hawaii

Please select one of the following great group descriptions below to further detail your location:

Anthr- located in a city with a lot of human activity and impact	**Lo**- located at an elevation lower than 1K ft
Aqu- impacted by a lot of rain	**Mou**- live on a mountain
Coas- located on or near the coast (~15 mi)	**Sno**- impacted by a lot of snow
Cry- cold most of the year	**Sun**- extreme exposure to sun
Des- located in the desert	**Ran**- live on a ranch or farm
Dry- dry land conditions	**Riv**- located near a prominent river or freshwater body
Emp- vast lands	**Roa**- live near a major highway or road
For- live in a forest	**Wet**- live very close to a wetland
Hi- located at an elevation higher than 5K ft	**War**- warm/hot most of the year
Inl- located inland	**Woo**- wooded area with a high presence of vegetation
Isl- located on an island	

Subgroup:

This category will detail the most defining and unique element of your location, that sets it apart from the rest of town. Consider any of the following below, however, we encourage you to come up with your most defining feature that comes to mind when you think of the landscape of your location. For example: If I live in Lousiana, I will first say I live in a warm/hot location, located near the coast, and in a wetland- so, I will designate this as…

_____, _____, _____, __Wetty Coaswarla

Please select one of the following subgroup descriptions below to further detail your location:

Anthro- located in a city with a lot of human activity and impact	**Mounty**- live on a mountain
Aquic- receives a lot of rain	**Snowy**- impacted by a lot of snow
Coasty- coastal conditions (~15 mi)	**Sunny**- extreme exposure to sun
Cryic- cold most of the year	**Ranchy**- live on a ranch or farm
Deserty- desert conditions	**Rivery**- located near a prominent river or freshwater body
Dryish- dry land conditions	**Roady**- live near a major highway or road
Empty- vast lands	**Typic**- very typical location for the state it is located in
Foresty- live in a forest	**Wetty**- live very close to a wetland

Highly- located at an elevation higher than 5K ft	**Warmish**- warm/hot most of the year
Inner- located inland	**Woodsy**- wooded area with a high presence of vegetation
Lower- located at an elevation lower than 1K ft	

Family:

This is where you can get creative! Provide three additional details about your location that people may not gather about this place, unless they have visited. Please keep each detail to one word or a hyphenated phrase. For example: if I took the previous example a step further, assuming I live in New Orleans, LA, it would look something like this:

spicy, jazzy, humid, Wetty Coaswarla

Here are some guidelines to use for family details:

Detail 1- something to describe the local cuisine/food

Detail 2- something to describe the local art, music, or recreation scene

Detail 3- something to describe the local weather

Series: Finally, your series name should be the name of your town or a fun nickname the locals give it.

For example: Again, if I was talking about New Orleans, LA, I would call it the “NOLA” series.

(If using a nickname, please make them all school appropriate)

This now brings us to our final classified location, described as:

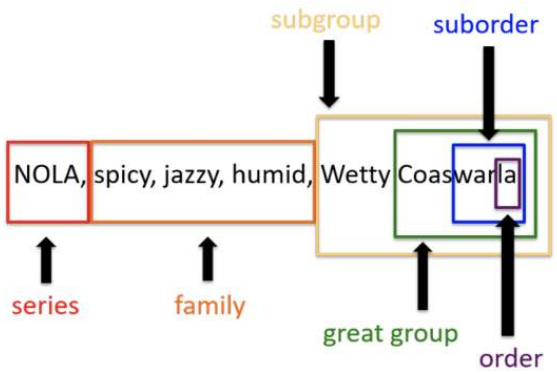

And when we compare our classified location to a similarly classified soil, it looks something like this:

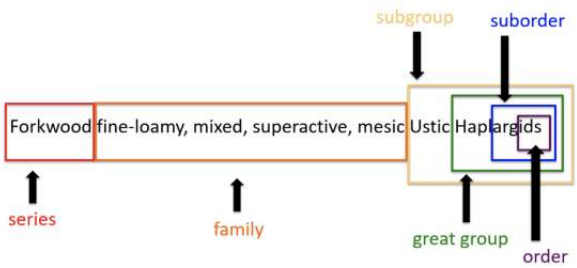

WHAT IS THE NAME OF YOUR FINAL CLASSIFIED LOCATION?

_____ _____, _____, _____, _____ _____

DISCUSSION: In groups of 2-3, share your full classification name and discuss how your location compares to you peers'. Do you see some similarities? Differences? Do you think each location is described accurately?

TEMPERATURE AND MOISTURE REGIMES

Temperature and moisture play a critical role in soil formation and the morphological expression of soil. More importantly, specified temperature and moisture regimes are used to determine specific portions of the classification of a soil (i.e. suborder, family).

Temperature regimes:

Gelic: < 0°C	Mesic: 8-15°C
Cryic: 0-8°C (cold summers)	Thermic: 15-22°C
Frigid: 0-8°C (warm summers)	Hyperthermic: >22°C

Moisture regimes:

Aquic: (or Perudic): Saturated with water long enough to cause oxygen depletion
Udic: Humid or subhumid climate
Ustic: Semiarid climate
Aridic (or Torric): Arid climate
Xeric: Mediterranean climate (cool, moist winters and warm, dry summers)

HORIZONS AND CHARACTERISTICS DIAGNOSTIC FOR THE HIGHER CATEGORIES

Soil classification is determined by the detailed morphology described for each soil. From the morphology we can then determine horizons and characteristics that are indicative, or diagnostic, for higher categories of soil classification. This section is split up into three categories critical for soil classification within the Keys to Soil Taxonomy: 1) Diagnostic surface horizons, 2) Diagnostic subsurface horizons, and 3) Diagnostic characteristics.

Diagnostic surface horizons- Epipedons

The epipedon is a horizon that forms at or near the surface, to which a majority of the rock structure has been destroyed. This layer is typically darkened from organic inputs, shows eluviation, or both (refer to the Keys to Soil Taxonomy for further details). Important epipedons are outlined in detail below in, Table 2.

Table 2. Epipedons described by major defining features (Adapted from SOIL 2010 lecture: Vaughan, 2018).

Epipedon	Major Features
Mollic	Thick, organic-rich layer common in grasslands and is diagnostic for Mollisols. High base saturation.
Umbric	Acidic, similar to Mollic except less fertile with low base saturation
Histic	Dark, organic surface layer (not mineral soil). Typically formed in wet areas with low bulk density.
Mellanic	Organic-rich, volcanic surface layer.
Ochric	Low organic matter, light-colored, diagnostic for Aridisols.

Diagnostic subsurface horizons- Endopedons

Soils described in this section specifically form below the surface of the soil, however, in some areas they form directly below layer of a leaf litter if no epipedon is present. These horizons are comprised of mineral material and are generally identified as B horizons, or parts of A or E horizons. The most common endopedons are detailed below, in Table 3.

Table 3. Endopedons described by major defining features (Adapted from SOIL 2010 lecture: Vaughan, 2018).

Endopedon	Major features
Argillic (Bt)	High activity clay accumulation AND clay films present, common in mature soils of temperate regions. Diagnostic for Alfisols.
Oxic (Bo)	Highly weathered, usually reddish due to abundance of Fe oxides. Associated with Oxisols.
Spodic (Bh, Bs, Bhs)	Organic matter and/or Fe-Al oxides.
Albic (E)	Light colored where clays and organic matter have been removed by eluvial processes.
Cambic (Bw)	Changes in color or structure from A. Some horizon development. Diagnostic for Inceptisols.
Calcic (Bk)	Accumulation of $CaCO_3$ (calcite) or $CaMg\ (CO_3)_2$ (dolomite).
Petrocalcic (Bkm)	Cemented calcic horizon.
Duripan (Bqm)	Silica cemented horizon.

Diagnostic soil characteristics

Diagnostic soil characteristics are specific soil features used throughout the Keys to Soil Taxonomy, and more importantly, used to define specific diagnostic horizons. Important diagnostic soil characteristics are listed below, and further details are outlined in the

full-text version of *Keys to soil Taxonomy.*

• Abrupt textural change	• Aquic conditions
• Albic materials	• Cryoturbation
• Andic soil properties	• Densic contact
• Fragic soil properties	• Gelic materials
• Free carbonates	• Lithic contact
• Identifiable secondary carbonates	• Paralithic contact
• Lithologic discontinuity	• Paralithic materials
• Slickensides	• Permafrost
• Spodic materials	• Soil moisture regimes
• Volcanic glass	• Soil temperature regimes

This page titled 3.2: Pre-Class Activity- Classified Location Exercise is shared under a CC BY 4.0 license and was authored, remixed, and/or curated by Anna R. Schwyter & Karen L. Vaughan (UW Open Education Resources (OER)) via source content that was edited to the style and standards of the LibreTexts platform.

3.3: Activity 1- Horizons and Characteristics

Name: _____

Section: _____

Student ID#:_____

Your instructor has placed out soil descriptions for the Wycolo the Passcreek soil series, both located in Wyoming. Using the information provided, please answer the following questions:

1) What is the epipedon of…

a. Wycolo?

b. Passcreek?

2) What is the endopedon(s) of…

a. Wycolo?

What details/soil properties helped you come to this conclusion? (Please list)

b. Passcreek?

What details/soil properties helped you come to this conclusion? (Please list)

3) Please identify the temperature and moisture regimes for the following soils…

Wycolo T.R. = Passcreek T.R. =

Wycolo M.R. = Passcreek M.R. =

This page titled 3.3: Activity 1- Horizons and Characteristics is shared under a CC BY 4.0 license and was authored, remixed, and/or curated by Anna R. Schwyter & Karen L. Vaughan (UW Open Education Resources (OER)) via source content that was edited to the style and standards of the LibreTexts platform.

3.4: Activity 2 - Taxonomic Class

Name: _____

Section: _____

Student ID#:_____

1) *Now that you have studied the characteristics of the 12 soil orders, enter the most appropriate soil order name in each rectangle:*

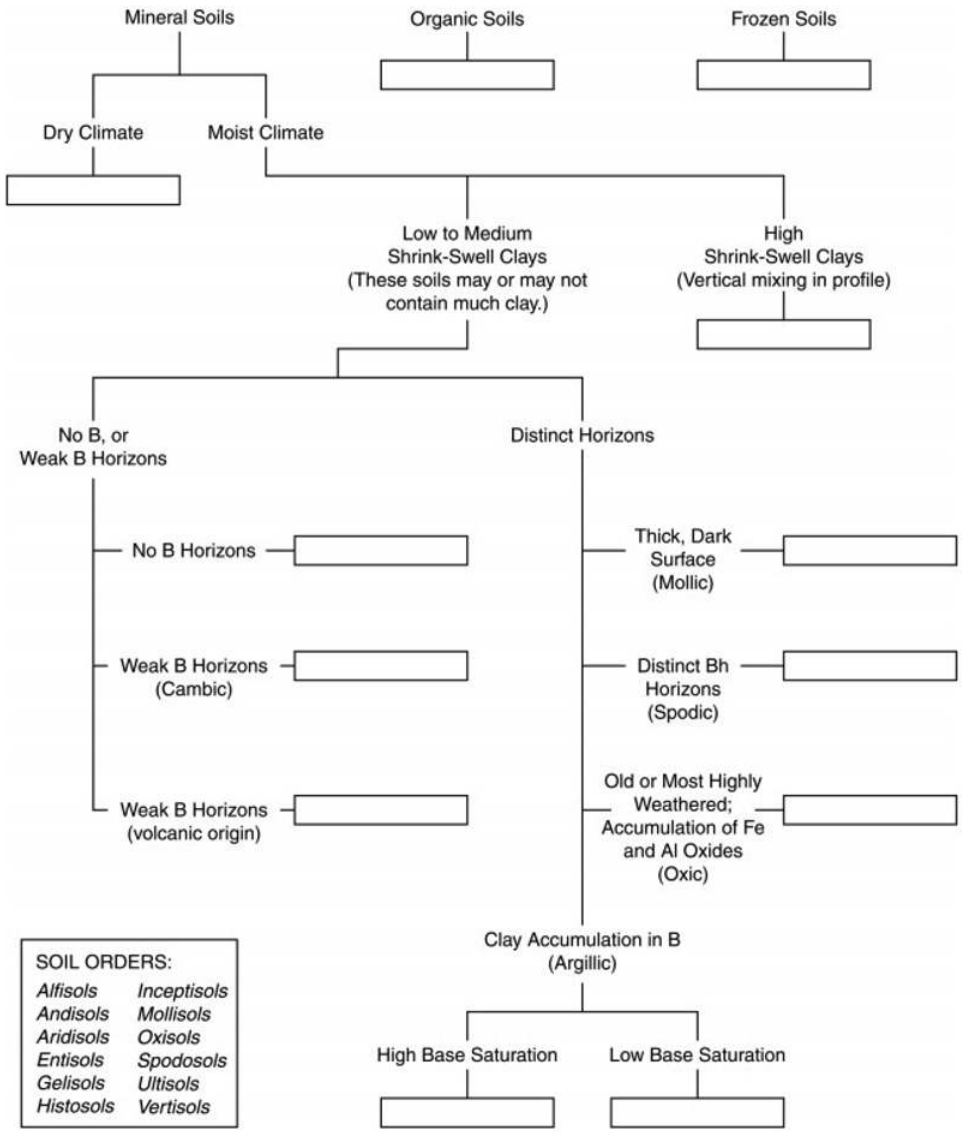

2) *To illustrate the structure of Soil Taxonomy, separate a complete taxonomic name into the 6 categories. Follow the example of the Harney silt loam earlier in this laboratory.*

a) <u>Colby:</u>

a. Taxonomic Name: Fine-silty, mixed, superactive, calcareous, mesic Aridic Ustorthents

b. Order-

c. Suborder-

d. Great Group-

e. Subgroup-

f. Family-

g. Series-

b) Goessel:

a. Taxonomic Name: Fine, smectitic, mesic Typic Haplusterts

b. Order-

c. Suborder-

d. Great Group-

e. Subgroup-

f. Family-

g. Series-

c) Wymore:

a. Taxonomic Name: Fine, smectitic, mesic Aquertic Argiudolls

b. Order-

c. Suborder-

d. Great Group-

e. Subgroup-

f. Family-

g. Series-

3) State soils have been selected for all 50 states and three territories in the U.S. The group of soils represents a diverse sample of soil conditions and classifications. It serves as an interesting focus for a little practice at deciphering and understanding Soil Taxonomy. Use the attached list of state soils in Table 9 to reference state soil information. Tables 4, 5, and 6 will also help you with this exercise.

a) What is the most commonly recognized ORDER among the state soils?

b) Which of the soil ORDERS is not represented in the list of state soils?

c) How many Oxisols are represented by the 53 soils?

d) What is the complete SUBORDER name for the state soil of Alaska?

e) How many Vertisols are represented in the state soils?

f) In what soil property does the Downer soils of New Jersey differ from the Greenwich soils of Delaware?

g) The state soil of South Carolina has a soil condition identified by its great group. What element is present in the upper 50 cm of this soil? (Hint: use Table 6)

h) What is the complete taxonomic name for the state soil of Wyoming?

Table 9. "Soil Taxonomy classifications of state soils of the U.S." by Colby J. Moorberg and David A. Crouse is licensed under CC by 4.0

SERIES	STATE	FAMILY CLASSIFICATION
Tanana	AK	coarse-loamy, mixed, superactive, subgelic Typic Aquiturbels
Bama	AL	fine-loamy, siliceous, subactive, thermic Typic Paleudults
Stuttgart	AR	fine, smectitic, thermic Albaquultic Hapludalfs
Casa Grande	AZ	fine-loamy, mixed, superactive, hyperthermic Typic Natrargids
San Joaquin	CA	fine, mixed, active, thermic Abruptic Durixeralfs
Seitz	CO	clayey-skeletal, smectitic Ustic Glossocryalfs
Windsor	CT	mixed, mesic Typic Udipsamments
Greenwich	DE	coarse-loamy, mixed, semiactive, mesic Typic Hapludults
Myakka	FL	sandy, siliceous, hyperthermic Aeric Alaquods
Tifton	GA	fine-loamy, kaolinitic, thermic Plinthic Kandiudults
Akina	GU	very-fine, kaolinitic, isohyperthermic Inceptic Haplustox
Hilo	HI	medial over hydrous, ferrihydritic, isohyperthermic Acrudoxic Hydrudands
Tama	IA	fine-silty, mixed, superactive, mesic Typic Argiudolls
Threebear	ID	medial over loamy, amorphic over mixed, superactive, frigid Oxyaquic Udivitrands
Drummer	IL	fine-silty, mixed, superactive, mesic Typic Endoaquolls
Miami	IN	fine-loamy, mixed, active, mesic Oxyaquic Hapludalfs
Harney	KS	fine, smectitic, mesic Typic Argiustolls
Crider	KY	fine-silty, mixed, active, mesic Typic Paleudalfs
Ruston	LA	fine-loamy, siliceous, semiactive, thermic Typic Paleudults
Paxton	MA	coarse-loamy, mixed, active, mesic Oxyaquic Dystrudepts
Sassafras	MD	fine-loamy, siliceous, semiactive, mesic Typic Hapludults
Chesuncook	ME	coarse-loamy, isotic, frigid Aquic Haplorthods
Kalkaska	MI	sandy, isotic, frigid Typic Haplorthods
Lester	MN	fine-loamy, mixed, superactive, mesic Mollic Hapludalfs
Menfro	MO	fine-silty, mixed, superactive, mesic Typic Hapludalfs
Natchez	MS	coarse-silty, mixed, superactive, thermic Typic Eutrudepts
Scobey	MT	fine, smectitic, frigid Aridic Argiustolls
Cecil	NC	fine, kaolinitic, thermic Typic Kanhapludults
Williams	ND	fine-loamy, mixed, superactive, frigid Typic Argiustolls

SERIES	STATE	FAMILY CLASSIFICATION
Holdrege	NE	fine-silty, mixed, superactive, mesic Typic Argiustolls
Marlow	NH	coarse-loamy, isotic, frigid Oxyaquic Haplorthods
Downer	NJ	coarse-loamy, siliceous, semiactive, mesic Typic Hapludults
Penistaja	NM	fine-loamy, mixed, superactive, mesic Ustic Haplargids
Orovada	NV	coarse-loamy, mixed, superactive, mesic Durinodic Xeric Haplocambids
Honeoye	NY	fine-loamy, mixed, semiactive, mesic Glossic Hapludalfs
Miamian	OH	fine, mixed, active, mesic Oxyaquic Hapludalfs
Port	OR	fine-silty, mixed, superactive, thermic Cumulic Haplustolls
Hazleton	PA	loamy-skeletal, siliceous, active, mesic Typic Dystrudepts
Bayamon	PR	very-fine, kaolinitic, isohyperthermic Typic Hapludox
Narragansett	RI	coarse-loamy over sandy or sandy-skeletal, mixed, active, mesic Typic Dystrudepts
Bohicket	SC	fine, mixed, superactive, nonacid, thermic Typic Sulfaquents
Houdek	SD	fine-loamy, mixed, superactive, mesic Typic Argiustolls
Dickson	TN	fine-silty, siliceous, semiactive, thermic Glossic Fragiudults
Houston Black	TX	fine, smectitic, thermic Udic Haplusterts
Taylorsflat	UT	fine-loamy, mixed, superactive, mesic Xeric Haplocalcids
Pamunkey	VA	fine-loamy, mixed, semiactive, thermic Ultic Hapludalfs
Victory	VI	loamy-skeletal, mixed, superactive, isohyperthermic Typic Haplustepts
Tunbridge	VT	coarse-loamy, isotic, frigid Typic Haplorthods
Tokul	WA	medial, amorphic, mesic Aquic Vitrixerands
Antigo	WI	coarse-loamy over sandy or sandy-skeletal, mixed, superactive, frigid Haplic Glossudalfs
Monongahela	WV	fine-loamy, mixed, semiactive, mesic Typic Fragiudults
Forkwood	WY	fine-loamy, mixed, superactive, mesic Ustic Haplargids

This page titled 3.4: Activity 2 - Taxonomic Class is shared under a CC BY 4.0 license and was authored, remixed, and/or curated by Anna R. Schwyter & Karen L. Vaughan (UW Open Education Resources (OER)) via source content that was edited to the style and standards of the LibreTexts platform.

CHAPTER OVERVIEW

4: Soil Survey and Mapping

Learning Objectives

- To be able to obtain soil survey data.
- To become familiar with the information provided in a soil survey report.
- To learn how to evaluate the suitability of soils for both agricultural and non-agricultural uses.
- To navigate Web Soil Survey and generate a custom soil survey report.

GOAL: To become familiar with and learn how to use soil survey data

4.1: Introduction- Soil Survey Reports
4.2: What is a soil survey?
4.3: Challenges in soil surveying
4.4: Responsibility for soil surveys
4.5: Activity 1 - Using Web Soil Survey

Additional resources:

- The following web site can be accessed to obtain the official series description for specific soil series: http://soils.usda.gov/ and https://soilseries.sc.egov.usda.gov/osdname.aspx
- Video link: Using the Web Soil Survey Tool https://youtu.be/fzpKPIJajdQ

This page titled 4: Soil Survey and Mapping is shared under a CC BY 4.0 license and was authored, remixed, and/or curated by Anna R. Schwyter & Karen L. Vaughan (UW Open Education Resources (OER)) via source content that was edited to the style and standards of the LibreTexts platform.

4.1: Introduction- Soil Survey Reports

The properties of each soil must be understood to ensure proper use and management. To consider the soil in land use planning and development, an inventory is essential in determining the location and extent of the various kinds of soil. This inventory is called a soil survey.

Soil surveys began in 1898 in the United States. The study of soils was initially conducted for agriculture and forestry, with little attention given to the ways in which soil properties might influence urban use of land. Modern soil surveys now include information about multipurpose uses of soils. These include interpretation information for wildlife management, development of parks and recreation areas, construction potentials for super highways, airports, and building foundations, selection of pipeline right-of-ways, evaluation of the pollution potential from septic tanks, selection of desirable spatial distribution patterns for residential, commercial, industrial, agricultural, and recreational land use development, implementation of zoning and subdivision control, and land evaluation for equitable tax assessments and bank loan appraisals.

This page titled 4.1: Introduction- Soil Survey Reports is shared under a CC BY 4.0 license and was authored, remixed, and/or curated by Anna R. Schwyter & Karen L. Vaughan (UW Open Education Resources (OER)) via source content that was edited to the style and standards of the LibreTexts platform.

4.2: What is a soil survey?

A soil survey is a detailed inventory of the soil resources within an area. It consists of a set of soil maps and a book that describes, classifies, and interpret soil data for various land uses. It is developed by professional soil scientists who examine the soil in detail to a depth of two meters, or to rock if shallower. The soil is then classified according to a national system of soil taxonomy. The location of each kind of soil is plotted on aerial photographs. Each soil is evaluated for its suitability for various uses and management.

Soil surveys are made in the following manner: air photo reconnaissance flights are made of the area to obtain stereoscopic map photos. These photos permit one to see artificial and natural land features. In preparing a soil survey, the scientists familiarize themselves with the various soils in the area by digging many holes to expose and carefully examine the soil profile in its natural state. As they travel around the survey area, they observe steepness, the length and shape of slopes, the size and speed of streams, the kinds of trees, plants and crops, the kinds of rock exposed, and many facts about the soils.

Soil scientists compare the soil profiles in the survey area with soils in nearby counties and states. They correlate, classify and name the different soils according to the National Cooperative Soil Survey as set forth in the United States Department of Agriculture (USDA) Agricultural Handbook No. 18, Soil Survey Manual (August, 1951). Details of the classification are presented in the book Soil Taxonomy: A basic system of soil classification for making and interpreting soil surveys written by the Soil Survey Staff of the Soil Conservation Service (now the Natural Resource Conservation Service). It was published in December of 1975 as USDA Agricultural Handbook No. 436.

Once the soils have been named and their distinguishing properties identified, the soil scientists return to the field to examine all soils in the survey area. They delineate areas of similar soils directly on the aerial photographs. While the field work is in progress, other soil samples are collected and analyzed to determine chemical, physical, and mineralogical properties. The mass of detailed information about the soils needs to be organized and interpreted in a readily useful way to different groups of readers.

For many years, farmers and ranchers have used soil surveys to determine the capability of the soil to support certain kinds of crops, grasses, and trees. Also, soil surveys have served as a basis for applying needed soil and water conservation practices.

After studying the soils in an area, it is possible to make a general map showing several main patterns of soils (called soil associations). As a rule, each soil association contains a few major soils and several minor soils in a characteristic, although not strictly uniform, pattern. The soil maps are assembled and examined for continuity of soil boundaries from one photo to another and the other information is compiled into a written report.

The written report and the aerial photographs with the soil boundaries are sent to the U.S. Government Printing Office for publication. This entire process of obtaining aerial photos, field mapping, correlation and interpretation of the data, writing of the report, and subsequent publication takes several years for completion.

Soil surveys produced in this manner cost taxpayers $500 to $750 per square mile. Large expanses of land that are of little direct value for agricultural or forest uses often are too poor to justify this high cost. These low value areas are mapped on a small scale and the resulting study is called a reconnaissance survey. The reconnaissance survey identifies areas and regions dominated by soil associations in contrast to the detailed map where specific soils are delineated.

This page titled 4.2: What is a soil survey? is shared under a CC BY 4.0 license and was authored, remixed, and/or curated by Anna R. Schwyter & Karen L. Vaughan (UW Open Education Resources (OER)) via source content that was edited to the style and standards of the LibreTexts platform.

4.3: Challenges in soil surveying

Several problems unique to the field work and mapping occur in soil surveys. Because soil series vary so much in slope, degree of erosion, number and size of stones, or some other feature affecting their use, practical suggestions about their management could not be made if they were shown on the soil map as one unit. Such soil series are divided into soil phases. The name of the soil phase indicates the surface feature most affecting its management. For example, Vina loam, 0 to 2 percent slopes; Vina loam, 2 to 9 percent slopes; Vina gravelly loam, 2 to 9 percent slopes; and Vina silty clay loam, 2 to 9 percent slopes are four soil phases of the Vina series.

The area enclosed within each continuous line on a soil map is the delineation of a map unit. The map unit includes the soil phase and all inclusions. A problem for the soil scientist arises in delineating areas where several different soils are so intricately associated and so small in size it is not practical to show them separately on the aerial photo maps. Therefore, they show this conglomerate of soils as one mapping unit and call it a soil complex.

Ordinarily, a soil complex is named for the major kinds of soils in it. For example, *Castaic-Balcom complex, 9 to 15 percent slopes, eroded and Millsholm-Malibu complex, 30 to 50 percent slopes, eroded* occur in the Ventura Area Soil Survey.

Another problem occurs when the soils have been disturbed by road work and other mining or construction activities to such an extent the original characteristics of the soil have been obliterated. These areas are delineated on the soil map as are other map units by being called "made land”, "pits and dumps”, and "fill land”. Other natural non-soil areas are given descriptive names such as: “badland”, "igneous rock land”, "landslides”, "sandy alluvial land", and “terrace escarpments”.

This page titled 4.3: Challenges in soil surveying is shared under a CC BY 4.0 license and was authored, remixed, and/or curated by Anna R. Schwyter & Karen L. Vaughan (UW Open Education Resources (OER)) via source content that was edited to the style and standards of the LibreTexts platform.

4.4: Responsibility for soil surveys

The Natural Resource Conservation Service (formerly the Soil Conservation Service) of the USDA has the primary authority and responsibility for soil surveys. In some areas, the Forest Service, the Bureau of Indian Affairs, the Bureau of Reclamation, or the Bureau of Land Management conduct surveys of lands within their jurisdictions. Other state agencies such as departments of natural resources or conservation and the county or city governments may cooperate. This joint effort is called the National Cooperative Soil Survey.

The United States Department of Agriculture Natural Resource Conservation Service (USDA NRCS) today provides these soil surveys in a digital format through the Web Soil Survey (United States Department of Agriculture Natural Resources Conservation Service, 2016). The Web Soil Survey provides all the information previously contained in the county soil survey reports. It also contains additional tools and information that has not been available in printed versions of the soil surveys. Another advantage of the Web Soil Survey is that the information contained in it can be updated as needed, instead of being updated following new surveys of the same county, which take 30 to 60 years! Your instructor will walk you through some of the main features of the Web Soil Survey and show you how to request a PDF copy of a soil survey report for a designated area. You will use these skills for your Soil Survey Report assignment.

Read through and complete the following activity and questions. All questions should be answered and completed labs are due at the end of the laboratory period. No late work will be accepted.

This page titled 4.4: Responsibility for soil surveys is shared under a CC BY 4.0 license and was authored, remixed, and/or curated by Anna R. Schwyter & Karen L. Vaughan (UW Open Education Resources (OER)) via source content that was edited to the style and standards of the LibreTexts platform.

4.5: Activity 1 - Using Web Soil Survey

Name: _____

Section: _____

Student ID#:_____

Read through and complete the following activity and questions. All questions should be answered and completed labs are due at the end of the laboratory period. No late work will be accepted.

Video link: Using the Web Soil Survey Tool https://youtu.be/fzpKPIJajdQ

To begin this project, go to http://websoilsurvey.nrcs.usda.gov/app/.

- Read Welcome to Web Soil Survey and Three Basic Steps.
- Click on the green START WSS icon.
- You will be choosing an Area of Interest (AOIs) following the instructions on the web site.
  - Your AOI can be anywhere in the United States where soil survey information is available.
  - For purposes of this assignment, your AOI should be approximately 1000-2000 acres in size.

1. In what state(s) is your AOI located? _____

SOIL MAP UNITS

2. For the AOI you have selected, go to the Soil Map tab (located near top of page) to generate a map showing the AOI and its component soil map units. Save a PDF this map of your AOI and attach it to this report.

Generate the soil map report for your AOI (go to the "shopping cart" and generate a pdf). Include this pdf as part of your final assignment submission with the subject line "LAST NAME WSS lab."

3. Choose a particular point location on each of the maps – this can be a house, school, part of a ranch, etc.

4. Determine which soil map unit contains the selected point.

map unit symbol:

map unit name:

What percentage of the AOI does this map unit occupy?

Which soil series makes up most of this map unit?

SOIL DATA EXPLORER

Next, you will examine information about soil properties and land-use interpretations for your map units. Answer questions 5-12 for the chosen map unit from your AOI.

Go to the **Soil Data Explorer** tab and then select the tab heading entitled *Soil Properties and Qualities.*

5. Select *Water Features* and determine *Depth to Water Table* for your map unit. Do this by clicking on the *View Rating* button. You can use all of the default settings.

Depth to water table = _____ (include units)

6. Next, select *Soil Physical Properties*.

What is the *Surface Texture* for your map unit? _____

Find the *Bulk Density (One-Third Bar)* for the surface layer of your map unit (you will have to use *Advanced Options > Layer Options > Surface Layer* to get information for the surface layer).

Surface layer bulk density = _____

7. Now select *Soil Chemical Properties*. Find the *pH (1 to 1 water)* for the surface soil layer of your map unit (you will have to use *Advanced Options* > *Layer Options* > *Surface Layer* to get information for the surface layer).

Surface layer pH = _____

8. Now select *Soil Qualities and Features*. Find the *Depth to Any Soil Restrictive Layer* for your map unit (default settings are OK).

Depth to any soil restrictive layer = _____

Soil depth class = _____

Depth Class	Soil Depth (cm)
Very shallow	0-20
Shallow	20-50
Moderately deep or Moderately Shallow	50-100
Deep	100-150
Very deep	>150

While still under the ***Soil Data Explorer*** tab, select the tab heading entitled *Suitabilities and Limitations for Use* – it's located immediately to the left of the *Soil Properties and Qualities* tab heading.

9. Determine the suitability of your soil map unit for *Dwellings with Basements*. This can be found under the *Building Site Development* tab (default settings are OK).

What is the rating? _____

List the reason(s) for the rating _____

10. Determine the suitability of your soil map unit for *Local Roads and Streets*. This is also found under the *Building Site Development* tab (default settings are OK).

What is the rating? _____

List the reason(s) for the rating _____

11. Click on the *Vegetative Productivity* tab. Determine the suitability of your soil map unit for one of the categories listed (this will vary depending on geographical location).

List the category (e.g. *Yields of Irrigated Crops*, *Range Production*, etc.)

What is the rating? _____ (describe as needed)

12. Click on the *Waste Management* tab. Determine the suitability of your soil map unit for *Disposal of Wastewater by Irrigation* (default settings are OK).

What is the rating? _____

List the reason(s) for the rating _____

GENERAL QUESTIONS

13. In your own words, give a definition of a soil map unit. A couple of sentences should be adequate to do this, but make sure your definition mentions soil series.

14. Explain why it is necessary to use soil series rather than higher levels of the classification system (i.e. order, suborder) as the basis for detailed soil mapping.

15. Based on all of the information you have found in Web Soil Survey, provide a general assessment of the selected soil map units from your AOI relative to their use and management. Describe any relevant soil or site properties that result in limitations for the variety of land uses that are assessed in Web Soil Survey.

This page titled 4.5: Activity 1 - Using Web Soil Survey is shared under a CC BY 4.0 license and was authored, remixed, and/or curated by Anna R. Schwyter & Karen L. Vaughan (UW Open Education Resources (OER)) via source content that was edited to the style and standards of the LibreTexts platform.

CHAPTER OVERVIEW

5: Soil Physical Properties & Soil-Water Relations

Learning Objectives

- Define soil texture and understand its influence on water infiltration, percolation and soil water holding capacity
- Understand the relationship between soil texture and structure
- Describe the relationships between bulk density and porosity and particle density and porosity
- Learn to calculate bulk density, particle density, and porosity of a soil sample
- Measure soil moisture to examine the influence of density and texture on water holding capacity
- Identify conditions under which soil is most susceptible to erosion by water and wind

GOAL: To understand soil texture and structure and their influence on soilwater relations

5.1: Introduction- Soil Texture, Structure and Water Relations
5.2: Bulk Density, Porosity, Particle Density of Soil
5.3: Bulk Density
5.4: Particle Density
5.5: Porosity
5.6: Sampling
5.7: Soil-Water Relations
5.8: Soil Erosion
5.9: Activity 1 - Bulk Density and Porosity of Soil Cores
5.10: Activity 2 - Soil Moisture
5.11: Activity 3 - Soil Water Movement
5.12: Activity 4 - Infiltration Estimates and Available Water Calculations
5.13: Activity 5 - Effects of Soil Erosion

Additional resources:

- Chapter 17 (Soil Erosion and its Control) of the Brady and Weil: Elements of the Nature and Properties of Soils textbook
- Raindrop impact on a sandy surface video: https://www.youtube.com/watch?v=bmRY...nel=APSPhysics
- Wind erosion video by M&M Divide RC&D: https://www.youtube.com/watch?v=PQmon7Rj6ns (length 3:03)
- Soil data explorer available from UC Davis: https://casoilresource.lawr.ucdavis.edu/gmap/

This page titled 5: Soil Physical Properties & Soil-Water Relations is shared under a CC BY 4.0 license and was authored, remixed, and/or curated by Anna R. Schwyter & Karen L. Vaughan (UW Open Education Resources (OER)) via source content that was edited to the style and standards of the LibreTexts platform.

5.1: Introduction- Soil Texture, Structure and Water Relations

In this lab, you will observe examples of soil textures and structures independently. Second, you will observe the effects of texture and structure on water percolation. Third, you will measure the water holding capacity of a coarse and fine textured soil. During the exercise, try to think about how the concepts you are learning can be applied to your major area of interest.

This page titled 5.1: Introduction- Soil Texture, Structure and Water Relations is shared under a CC BY 4.0 license and was authored, remixed, and/or curated by Anna R. Schwyter & Karen L. Vaughan (UW Open Education Resources (OER)) via source content that was edited to the style and standards of the LibreTexts platform.

5.2: Bulk Density, Porosity, Particle Density of Soil

Soil is a unique three-phase system composed of solids (soil particles), liquid (water), and gases (the soil atmosphere). The characteristics and interactions among these three phases determine the soil's physical properties. Bulk density, particle density, and porosity are three soil physical properties exemplifying the relationships among the soil phases. The volume of voids in soil is related to the percentages of sand, silt and clay (soil texture) and to the arrangement of these soil particles soil structure.

The texture and structure of soil determine the size and distribution of the pores and the total porosity of the soil. This empty space in soil enables root growth, water retention, atmospheric gas exchange, and water drainage. A soil ideal for plant growth will have approximately 50% of its total volume as pore space. Sands contain less pore space than any of the other textures and clay usually has the most. The porosity of a soil can be reduced by compaction or be increased by the addition of organic matter to improve a soil's aggregation (structure).

Two factors must be known about a soil before its porosity can be calculated: bulk density and particle density (Figure 1).

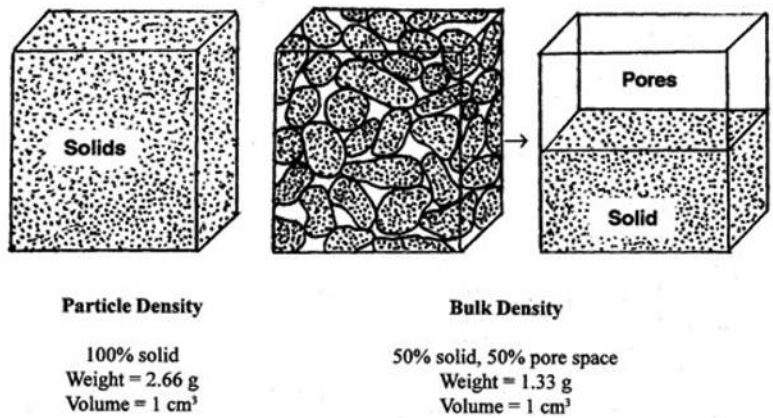

Figure 1. Illustration of the difference between bulk density and particle density by Plant and Soil Science eLibrary used with written consent.

This page titled 5.2: Bulk Density, Porosity, Particle Density of Soil is shared under a CC BY 4.0 license and was authored, remixed, and/or curated by Anna R. Schwyter & Karen L. Vaughan (UW Open Education Resources (OER)) via source content that was edited to the style and standards of the LibreTexts platform.

5.3: Bulk Density

Bulk density is the dry mass of a soil divided by the total soil volume. The bulk density value for soil is calculated using the formula:

Bulk Density = mass (g) oven dry soil / total soil volume (cm^3)

$$D_b = \frac{ODwt}{V_t}$$

Some typical values for the bulk density of soils having different textures along with the corresponding porosity percentages are given In Table 1.

Table 1. Typical bulk density, porosity, and pore size distribution of several soils.

	Bulk Density (g/cm^3)		Particle Density (g/cm^3)	Porosity (%)		Pore Size
Soil Texture	Range	Average		Range	Average	
Sands & Sandy loams	1.2 to 1.8	1.5	2.65	55 to 32	43	Macro
Loams & Silt loams	1.1 to 1.5	1.3	2.65	58 to 43	50	Macro & Micro
Clay loams and Clay	1.0 to 1.5	1.2	2.65	62 to 32	55	Micro

For a particular soil, the bulk density may vary due to compaction or loosening as a result of tillage operations, or other forms of soil disturbance. Variation of bulk density means the porosity will also change. Some soils (surface of forest soils, Histosols, and soils derived from volcanic ash) have very low bulk density values (often less than 1.0 gram/cm^3), due to high porosity.

This page titled 5.3: Bulk Density is shared under a CC BY 4.0 license and was authored, remixed, and/or curated by Anna R. Schwyter & Karen L. Vaughan (UW Open Education Resources (OER)) via source content that was edited to the style and standards of the LibreTexts platform.

5.4: Particle Density

The **particle density** of a soil = dry mass (g) of soil / volume of soil particles.

$$D_p = \frac{ODwt}{V_s}$$

Where D_p is particle density; ODwt is oven-dry weight of soil; V_s is volume of solids. Particle density takes into account the mass and volume occupied by the **solid particles only**. It excludes the volume occupied by air and water. Since a majority of soils is composed of particles derived from minerals containing 70% or more silica and oxygen, the particle density of most soils is approximately 2.65 g/cm^3 . This particle density is nearly the same as the density of quartz.

Variations in the particle density of soils are due to the presence of heavier minerals (such as iron oxides) or organic matter (which has a low density and reduces the overall particle density value). Kaolinite and illite clays have particle densities of about 2.6 g/cm^3 , while colloidal montmorillonite clays have particle densities of about 2.4 g/cm^3.

Although tillage results in a change in both bulk density and porosity, it does **not** affect particle density. The particle density remains constant because tillage and other short-term changes do not alter the total amount or the chemical composition of the soil mineral particles.

This page titled 5.4: Particle Density is shared under a CC BY 4.0 license and was authored, remixed, and/or curated by Anna R. Schwyter & Karen L. Vaughan (UW Open Education Resources (OER)) via source content that was edited to the style and standards of the LibreTexts platform.

5.5: Porosity

Porosity (percentage of total pore space) is the volume of the soil occupied by pores.

$$\%P = \frac{V_p}{V_t} \times 100$$

Where %P is percent porosity; Vp is volume of pores; Vt is volume total (solids plus pores). The total volume of pores is usually greater in a well-structured fine-textured (clayey) soil than in a coarse-textured (sandy) soil. However, the individual pores tend to be larger in sandy soils than in clayey soils (which have many more micro pores). But why can a soil which has larger pores have less total pore space than a soil which has smaller pores?

Although a soil's total porosity is important, its **pore size distribution** is equally important. Individual pores can be categorized as macro pores and micro pores. The large (macro) pores drain quickly of excess water and allow free movement of air and water. These macro-pores promote soil aeration (free movement of gases) and enhance water infiltration, percolation and drainage. Soils containing a large proportion of macro pores are usually very sandy and tend to retain only a limited amount of water. The small (micro) pores retain much more water, and consequently drain slowly and have restricted air and water movement. Restricted soil aeration causes reduced plant growth because roots need oxygen to conduct the process of root respiration in every cell. Also, many microorganisms require oxygen - therefore, some biological and chemical reactions are inhibited by poor aeration.

Aggregation, or the clustering of the soil particles into aggregates, creates larger macro pores between the peds, which enhance aeration and root penetration. Within each aggregate exist smaller micro pores that function primarily to retain water. A balance between macropores and micropores is desirable for most agricultural situations to provide both adequate aeration and optimum water retention for crop growth.

If the bulk density and the particle density of a soil are known, then the porosity can be calculated by using the following relationship:

Since, 100 % total soil volume = % solid volume + % pore volume then, % total pore volume = 100% total soil volume - % solid volume

$$\%P = \%V_t - \%V_s$$

This last equation can be used to determine the porosity, if one recognizes the % solid volume can be obtained by dividing the bulk density by the particle density and multiplying the quantity by 100. The resulting equation becomes:

$$\%P = 100\% - \left(\frac{D_b}{D_p} \times 100\right)$$

Note, the units of bulk density and particle density must be the same for them to be able to cancel in the calculation. The term in brackets, i.e. [bulk density / particle density x 100] represents the percentage of the soil volume occupied by the soil solids. When the volume of soil solids is subtracted from 100%, the difference is the percentage of the soil volume occupied by pores, or the total porosity or total pore space.

This page titled 5.5: Porosity is shared under a CC BY 4.0 license and was authored, remixed, and/or curated by Anna R. Schwyter & Karen L. Vaughan (UW Open Education Resources (OER)) via source content that was edited to the style and standards of the LibreTexts platform.

5.6: Sampling

Samples for determining bulk density must be collected very carefully to ensure the sample represents the in situ condition desired and no additional compaction or loosening has occurred. One method for determining bulk density is the “core” method. A (relatively) undisturbed, cylindrical soil core (of known volume) is collected using a device like the one in Figure 2.

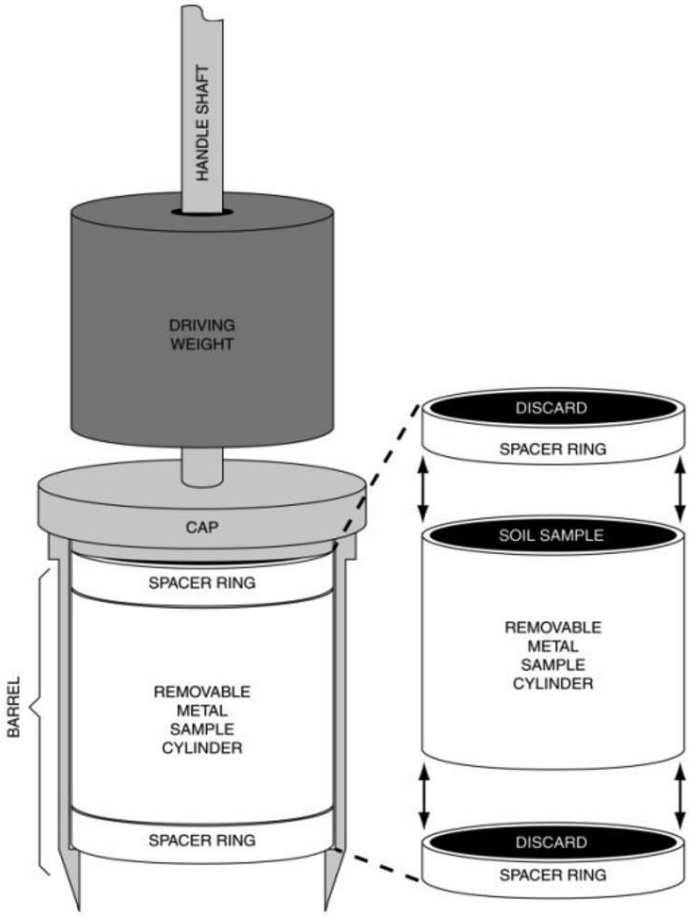

Figure 2. Uhland sampler for collecting soil samples for bulk density determinations Source: King et al. 2003.

The driving weight is raised and dropped repeatedly to drive the sampler into the soil. When the desired depth is reached, the device is removed from the soil, and the removable metal cylinder containing the soil sample is removed. With the dimensions of the cylinder and the weight of oven-dry soil inside the cylinder, we can calculate the bulk density.

Please watch the following video for proper bulk density soil sampling technique; the "core method" is what you will be using, which begins at 22:20.

Video: A video job aid on the three preferred methods for collecting bulk density samples in soils using National Cooperative Soil Survey methods and references. https://youtu.be/E7BSZrJ-TDw?t=1341

This page titled 5.6: Sampling is shared under a CC BY 4.0 license and was authored, remixed, and/or curated by Anna R. Schwyter & Karen L. Vaughan (UW Open Education Resources (OER)) via source content that was edited to the style and standards of the LibreTexts platform.

5.7: Soil-Water Relations

Soil water is of great importance because of the many biological and chemical reactions occurring due to the presence of moisture in the soil. In a completely dry soil, very few physical or chemical reactions occur. In a moist soil, many reactions occur, while in a very wet soil, a completely different set of reactions occur. Additionally, the behavior of a soil is completely altered once the moisture/saturated conditions are altered, and these dynamics are specifically dependent upon soil texture and structure.

Plants use several mechanisms to obtain water from soil. Passive absorption is the most important process and accounts for more than 90% of the water absorbed by plants. Passive absorption is the movement of water into a plant root resulting from the pulling force (suction) on soil water caused by the continuous water column moving upward through the plant as water is lost at the leaf surface by transpiration. The transpiration process is the actual cause of the water loss due to the air being much drier than the water in the plant. The more water a plant removes from a soil, the more difficult it becomes for the plant roots to continue to obtain the remaining water from the soil. The plant roots must exert a greater suction on the water in the soil pores to enable the roots to extract more water for continued crop growth.

Plants are able to use only a portion of the total water held in the soil pore space. It is convenient to think of soil water as a continuum from completely wet (saturated) to completely dry (oven dry). This continuous spectrum of soil water is conveniently separated into crop and soil response regions (Figure 3). These divisions are based mainly on the soil water potential (or suction) designated in negative kilopascals (kPa) of pressure or positive kilopascals (kPa) of suction.

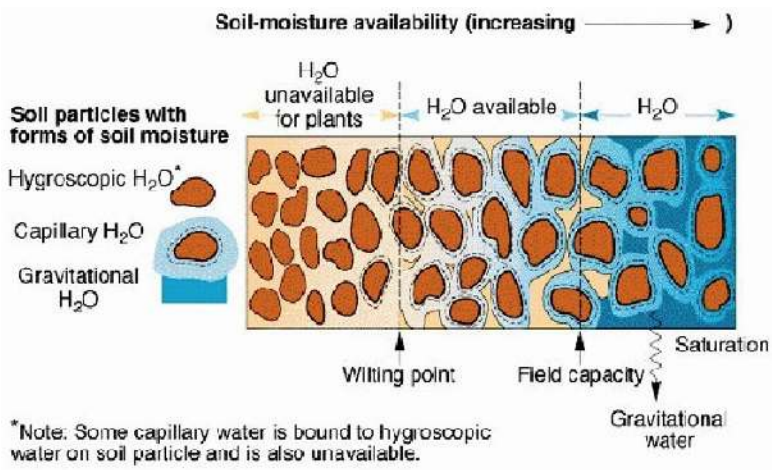

Figure 3. Detailed description of the association between crop and soil response regions and soilmoisture availability. Source: Rhoads and Yonts, 1984.

Water moves through a soil in the large pores and drains away due to the force of gravity. This water is called gravitational water. Gravitational water represents the difference in soil moisture content between the saturation condition and field capacity.

Gravitational water = soil moisture content at saturation - soil moisture content at field capacity.

Water held within small soil pores by adhesion and cohesion is termed **capillary water.** Only a portion of the total capillary water in the soil is available to plants. Plant available water can be obtained from the soil. **Plant available** water is the difference between the water content of a soil at field capacity and the soil water content at the permanent wilting point.

Plant available water = water content at field capacity - water content at permanent wilting point

Available water-holding capacity (plant available water) is an estimate of the water held between field capacity and permanent wilting point within the rooting zone or the top 150 cm of the soil if there is no root-limiting layer. The total water is calculated by summing the amount of water held in each horizon or portion of horizon, if the horizon extends beyond 150 cm. If a horizon or layer is unfavorable for roots, this and all horizons below should be excluded in calculating the available moisture.[1]

The relationship between available water retained per centimeter of soil and the textures is given in Table 2 below. If a soil contains many large pebbles and/or rock fragments, the volume occupied by the rock fragments must be estimated and subtracted from the total soil volume.

For example, if a silt loam A horizon is 25 cm thick and contains rock fragments which occupy 10% of its volume, the available water of the horizon would be 25 cm x 0.20 cm/cm x [(100-10)/100] = 4.50 cm of water.

To calculate the available water for a soil profile, first calculate the available water for each horizon to the nearest hundredth, sum all horizons, then round the grand total to the nearest tenth. For example, 14.92 would round to 14.9 in the low class; 15.15 would round to 15.2 in the moderate class.

Table 2. Calculation factors for water-holding capacity (Adapted from: 2018 Region VII Official Handbook)

Available Water Calculation Factors	
Available water (cm of water / cm of soil)	**Texture classes**
0.05	sands, loamy sands
0.15	textures not included in the other classes
0.20	silt loam, silt, silty clay loam, peat, muck, mucky peat
The available water classes are:	
Very low. Up to and including 7.5 cm of water	
Low. Greater than 7.5 cm of water but less than or equal to 15.0 cm of water	
Moderate. Greater than 15 cm of water but less than or equal to 22.5 cm of water	
High. Greater than 22.5 cm of water	

For most field crops, the **permanent wilting point** is equal to -1500 kPa of water potential or 1500 kPa of water suction. When a soil is air dry, the water present is held at water potentials ranging from -3000 to –10,000 kPa. The water in air dry soil is in equilibrium with the soil pore atmosphere which has about 98% relative humidity. The Hygroscopic Coefficient is the condition when the last micro pore is drained of water and only films of water exist surrounding the soil particles. Soil dried at 105°C to a constant weight is considered oven dry. The oven dry weight of soil is used as the reference weight to quantify the amount of water in mineral soils for all moisture conditions. **Hygroscopic water** is the water held between the Hygroscopic Coefficient and Oven dry.

Hygroscopic water content = Water held below the Hygroscopic Coefficient - Oven dry mass

[1] For available water calculations, the properties of the lowest horizon designated for description can be assumed to extend to 150 cm, if the presence of a restrictive layer is not evident. If a restrictive layer is present between the lowest described horizon and the 150 cm depth, the depth to the restrictive layer should be considered for available water estimations. Materials not suited for plant root growth include: (i) horizons with coarse sand textures and some unfilled voids located directly underneath a horizon of finer-textured soil materials (i.e., textures of very fine sand, loamy very fine sand or finer), (ii) bedrock, (iii) fragipans, (iv) densic materials, (v), horizons cemented across 90% or more of the soil profile, and (vi) SiC, C, or SC textures that are very firm or firmer and have structureless grade and massive shape of structure.

This page titled 5.7: Soil-Water Relations is shared under a CC BY 4.0 license and was authored, remixed, and/or curated by Anna R. Schwyter & Karen L. Vaughan (UW Open Education Resources (OER)) via source content that was edited to the style and standards of the LibreTexts platform.

SECTION OVERVIEW

5.8: Soil Erosion

Worldwide there are approximately five billion hectares of degraded land, which is approximately 43% of the Earth's land surface. Of those five billion hectares, the most common cause of degraded land (two billion hectares) is soil degradation due to erosion, compaction, surface crusting, acidification, or salt accumulation. Most of that degradation (85%) comes from water and wind erosion, however, other human activities such as overgrazing, industrial activities, unsustainable agricultural activities, overexploitation, and vegetation removal cause many negative side effects on the land ultimately causing degradation of the soil (Figure 4).

Type	Causes (not one to one along row)	Degradation process	Impact on soil processes
Physical	Deforestation	Breakdown of soil structure, aggregation and porosity	Reduction in infiltration capacity Changes in soil water-retention characteristics
	Biomass burning	Crusting and surface sealing	Increase in runoff rate and amount
	Tillage up and down slope, excessive animal, human, and machine traffic, overgrazing	Compaction of surface and subsoil, reduction in proportion and strength/stability of aggregates	Accelerated erosion by water and wind Increase in bulk density leading to reduction in porosity Water logging and anaerobiosis
Chemical	Irrigation with poor quality water, inadequate drainage	Salinization, alkalinization	Accumulation of base-forming cations
	Little to no use of fertilizers	Nutrient depletion	Decreased levels of macronutrients on exchange sites, soil organic matter, and in soil solution
	Excess use of fertilizers	Acidification, eutrophication	Leaching and runoff of nutrients to water sources
	Application of industrial, urban wastes	Toxification, contamination with heavy metals, pollution	Excessive build up of some elements (e.g., Al, Mn, Fe) and heavy metals (e.g., lead and mercury); increase in soilborne pathogens
Biological	Removal of or burning residues	Depletion of soil organic carbon	Reduction in N mineralization, soil aggregation, and related properties
	Little or no use of organic inputs	Decline in diversity and abundance of soil biota	Shift in species composition and diversity of favorable soil organisms
	Monoculture, excessive tillage	Loss of soil structure	Reduction in porosity and infiltration, reduction in activity of soil biota

Figure 4. The negative side-effects (physical, chemical, and biological) caused by various human impacts that degrade soil. Source: Palm et al., 2007.

Soil erosion includes two separate processes – soil erosion by water, and by wind.

Water erosion… begins with detachment as rain drops bombard soil aggregates, separating some of them from the aggregate. These stand-alone soil particles are much smaller and are more easily transported. The transported particles are eventually deposited in a low-lying area, completing the three-part process of detachment-transport-deposition (Figure 5). Transport can happen due to splashes from the raindrop, or from running water carrying sediment downhill.

Water erosion is initiated by sheet erosion where splashed soil is moved uniformly, but some columns of soil that were protected by pebbles may remain. When the water gathers into small channels due to irregularities in the landscape, those channels incise into the soil surface forming a rill. Rills can be smoothed by tillage equipment. If enough water gathers, a gully can form, which is essentially a large rill that is so deep that it cannot be smoothed by tillage equipment. Interrill erosion is sheet erosion that occurs between rills. The majority of soil erosion is due to sheet and rill erosion.

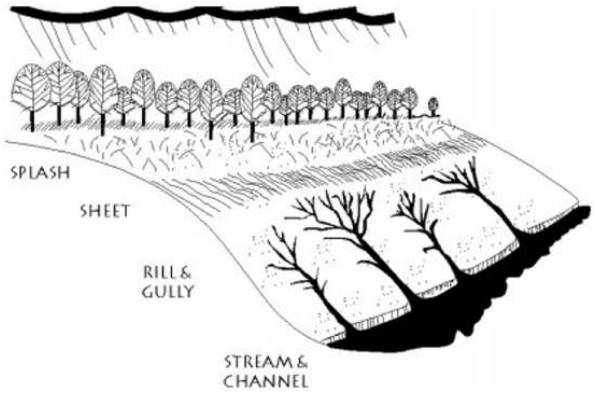

Figure 5. The effects of water erosion across the soil-landscape. Source: trival.co

Wind erosion… is greatest in arid and semiarid regions, such as Wyoming, though it can occur to some extent in humid regions. Similar to water erosion, wind erosion involves three processes – detachment, transportation, and deposition (Figure 6). Detachment occurs as heavy winds push and bounce heavy particles along the surface. As this happens, silt and clay particles can be broken away from aggregates and can become airborne and transported for great distances. The sediment is transported by three methods – saltation, soil creep, and suspension.

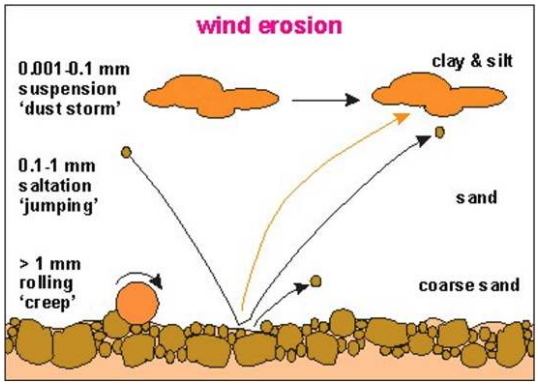

Figure 6. The effects of wind-erosion on soil. Source SeaFriends.

Read through and complete the following activity and questions. All questions should be answered and completed labs are due at the end of the laboratory period. No late work will be accepted.

This page titled 5.8: Soil Erosion is shared under a CC BY 4.0 license and was authored, remixed, and/or curated by Anna R. Schwyter & Karen L. Vaughan (UW Open Education Resources (OER)) via source content that was edited to the style and standards of the LibreTexts platform.

5.9: Activity 1 - Bulk Density and Porosity of Soil Cores

Name: _____

Section: _____

Student ID#:_____

Step 1: Three soil cores are displayed in metal cylinders. The volume of the cylinders and the mass of dry soil in each core are given. Using these data, determine the bulk density of each soil sample. Assume the particle density of the soil in all cores is 2.65 g/cm^3. Calculate the % porosity for each sample. Record the data and include the soil texture and soil condition (disturbed, compacted, or undisturbed) of each soil sample. Core volume $V = \pi r^2 h$.

Core	Description of soil texture and structural condition	Mass dry soil (g)	Bulk Density (g/cm^3)	Porosite (%)
1				
2				
3				
Core volume (cm^3)				

Step 2: Now that you have practiced calculating bulk density and porosity, you will do the same calculations for your prepared soil samples collected in the first week of lab.

Show your detailed Bulk density and porosity calculations:

Bulk Density = _____ g/cm^3

Porosity = _____ %

Bulk Density Questions

1. Explain how the addition of organic matter to these soils would affect their bulk density.
2. Which of these soils will usually have the higher bulk density, the sandy soil or clayey soil? Why?
3. How does your bulk density value from your ring sample compare with those given in Table 1?
4. Calculate the bulk density of a soil with a porosity of ___30%___ by using the porosity formula and assuming the particle density of this soil is 2.65 g/cm^3.

This page titled 5.9: Activity 1 - Bulk Density and Porosity of Soil Cores is shared under a CC BY 4.0 license and was authored, remixed, and/or curated by Anna R. Schwyter & Karen L. Vaughan (UW Open Education Resources (OER)) via source content that was edited to the style and standards of the LibreTexts platform.

5.10: Activity 2 - Soil Moisture

Name: _____

Section: _____

Student ID#:_____

1. A soil has ____15%___ water (on mass basis) when saturated, ___8%____ water at field capacity, ___5%___ water at the permanent wilting point, and ___2%____ water at the air dry condition. The soil weighed ___1.75_____ grams per cubic cm when oven dry.
   - The percentage of water available to plants at field capacity = _____
2. A moist sample of soil weighs 121.9 grams and contains 21.9 % moisture.
   - The oven dry mass of this soil = _____

This page titled 5.10: Activity 2 - Soil Moisture is shared under a CC BY 4.0 license and was authored, remixed, and/or curated by Anna R. Schwyter & Karen L. Vaughan (UW Open Education Resources (OER)) via source content that was edited to the style and standards of the LibreTexts platform.

5.11: Activity 3 - Soil Water Movement

Name: _____

Section: _____

Student ID#:_____

At your lab bench you will have 3 different soil texture classes (soils A, B, C) arranged in a funnel that has been prepared with a filter at the bottom. You will add a designated amount of water (50 mL) to each of the soil samples and record the time it takes before you see water move through the other end. After 2 minutes has passed you will also measure the amount of water that flowed through the soil into the catchment beaker. Record all observations below and answer the following questions:

SOIL A →	Time =	Volume water that flowed through =
SOIL B →	Time =	Volume water that flowed through =
SOIL C →	Time =	Volume water that flowed through =

1. Out of the following textures below, please indicate which was SOIL A, B, or C.
   - Sand =
   - Silty Clay Loam =
   - Clay =
2. Which texture class did the water move through the fastest? The slowest?
3. Why do you think this occurred?
4. What is a practical application of this method? (Aka why would you want to know this specific information about the soil?)

This page titled 5.11: Activity 3 - Soil Water Movement is shared under a CC BY 4.0 license and was authored, remixed, and/or curated by Anna R. Schwyter & Karen L. Vaughan (UW Open Education Resources (OER)) via source content that was edited to the style and standards of the LibreTexts platform.

5.12: Activity 4 - Infiltration Estimates and Available Water Calculations

Name: _____

Section: _____

Student ID#:_____

For this activity you will estimate and calculate the available water holding capacity of a soil using properties of structure and texture.

Step 1: Observe the range soil profile set out by your instructor. Determine the structure of each soil horizon using your red field guidebooks. Using the figure below, correlate the structure determined for each horizon to the rate of infiltration. Select the dominant rate of infiltration as your final estimate.

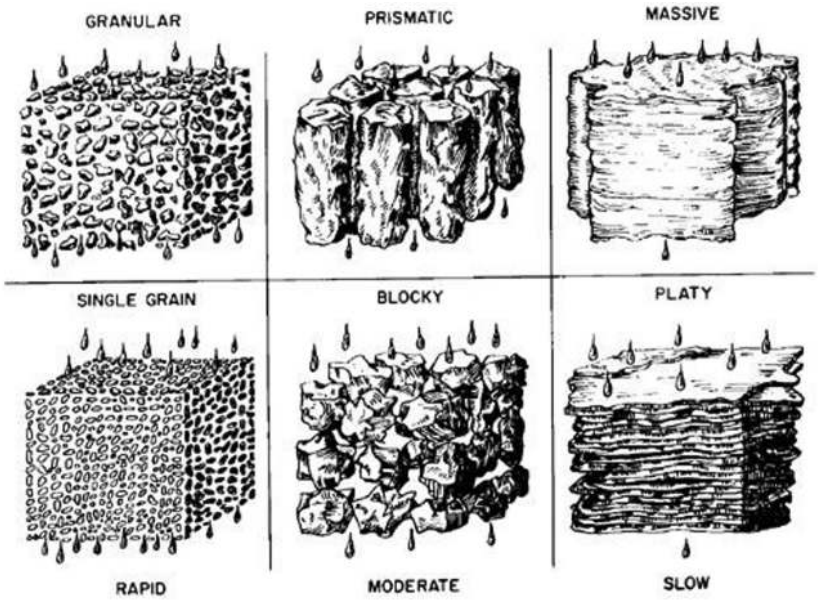

Horizon	Structure
1	
2	
3	
4	

Infiltration estimate

Step 2: Determine the texture for each soil horizon within the range soil profile. Based on your results and the relationship of texture and infiltration (which you just learned in Activity 3), what do you estimate the available-water holding capacity will be, (circle one of the following options on the following page):

Horizon	Texture
1	
2	
3	
4	

The available water classes are:

- **Very low**. Up to and including 7.5 cm of water
- **Low**. Greater than 7.5 cm but less than or equal to 15.0 cm of water
- **Moderate**. Greater than 15.0 cm but less than or equal to 22.5 cm of water
- **High**. Greater than 22.5 cm of water

Step 3: You will now calculate the available water holding capacity of your soil using your predetermined textures, the depths of each horizon, and the following information on coarse fragments provided below. Use Table 2 provided in the soil-water relations section to determine the calculation factors for each soil texture. Calculate the water holding capacity according to instructions provided in the text above, and assume that the depth boundary of the last horizon is 150 cm.

Horizon	Depth	Texture	Available water calculation factor	% Coarse fragment in horizon
1				0
2				5
3				15
4				20

Using the information in the table above, calculate your available-water to a depth of 150 cm for this range soil and using your final answer determine the final available-water class of this same soil:

Available-water calculated for soil profile = _____

Available-water class = _____

Follow-up questions:

1. Do your estimated infiltration rates and calculated available-water holding capacity make sense together? Please explain the relationship between the two, and **why or why not** they make sense together.
2. Did your estimated available-water holding capacity match your calculated available-water holding capacity? If not, where could you have assumed or calculated incorrectly?
3. Based on your final calculation would plants grow well in this soil? Why or why not?

This page titled 5.12: Activity 4 - Infiltration Estimates and Available Water Calculations is shared under a CC BY 4.0 license and was authored, remixed, and/or curated by Anna R. Schwyter & Karen L. Vaughan (UW Open Education Resources (OER)) via source content that was edited to the style and standards of the LibreTexts platform.

5.13: Activity 5 - Effects of Soil Erosion

Name: _____

Section: _____

Student ID#:_____

To better interpret that understandings of soil erosion, you will draw a BEFORE and AFTER erosion picture of an ecosystem of your choosing. Use elements and concepts outlined in Figure 4 to detail and label your drawings and incorporate AT LEAST 3 elements of erosion into your drawing. One of these elements must focus on water-erosion and one element on wind-erosion, the rest are up for you to decide!

The BEFORE picture will be used as a "control" system showing a pristine system, and your "AFTER" will detail the effects of soil erosion. Your pictures should detail both above ground and below ground (soil) effects of erosion.

Accompanying your BEFORE and AFTER drawings, please tell us a brief story **(3-5 sentences)** on how your soil degraded over time and how that impacted soil processes and ecosystem function.

BEFORE:

AFTER:

What happened to this system and its soil? (Describe below)

REMINDERS/Assignments for next week's lab:

a. Study for pre-lab Quiz on material from Lab #6: Science Communication
b. Choose one of the resources to read to prepare for lab
c. Prepare 4-5 facts on a chosen soil science topic that interests you. This could relate to something we have learned in lab or lecture, another course, work outside the university or a soil science-related cause you care deeply about. These facts will be the skeleton for next week's assignment.

This page titled 5.13: Activity 5 - Effects of Soil Erosion is shared under a CC BY 4.0 license and was authored, remixed, and/or curated by Anna R. Schwyter & Karen L. Vaughan (UW Open Education Resources (OER)) via source content that was edited to the style and standards of the LibreTexts platform.

CHAPTER OVERVIEW

6: Science Communication

Learning Objectives

- To understand what it means to “effectively communicate” scientific ideas and information
- To use multiple methods of communication to translate scientific concepts to different audiences
- To create your own infographic pertaining to a topic/facet of soil science

GOAL: To learn how to effectively communicate scientific ideas and understandings to a variety of audiences – with a focus on soil science!

6.1: Introduction
6.2: Activity

Additional resources:

- International year of the soils infographics - http://www.fao.org/soils2015/resourc...fographics/en/
- Nature blog on the power of infographics to communicate science – http://blogs.nature.com/ofschemesand...nicate-science
- Mind the graph blog post series on how to create infographics - https://blog.mindthegraph.com/how-to.../#.XETtrehKg2w

We will use canva.com in order to create quick and specially designed infographics, please sign up and familiarize yourself with this FREE program before class!

This page titled 6: Science Communication is shared under a CC BY 4.0 license and was authored, remixed, and/or curated by Anna R. Schwyter & Karen L. Vaughan (UW Open Education Resources (OER)) via source content that was edited to the style and standards of the LibreTexts platform.

6.1: Introduction

INTRODUCTION

Science communication is a growing area of practice and research and withholds particular value for natural sciences. Science communication is recognized as the public communication of science-related topics. The act of communicating science is carried out in many ways, encompassing science journalism, blogging, social media, videos, art, academic publishing, and any other activity that aims to help people understand anything related to research findings or the scientific process. Science communication is primarily broken down into two facets: 1) The science of science communication; and 2) The practice of science communication. The science of science communication breaks down what works effectively for communicating science, how it works, and why it works. While the practice of science communication is the actual implementation of communicating scientific ideas to a variety of audiences – and often multiple audiences!

WHY Communicate Science?

"When scientists are able to communicate effectively beyond their peers to broader, non-scientist audiences, it **builds support for science**, **promotes understanding** of its wider relevance to society, and encourages more **informed decision-making** at all levels, from government to communities to individuals. It can also **make science accessible** to audiences that traditionally have been excluded from the process of science. It can help **make science more diverse and inclusive**."

(*Feliú-Mójer, 2015, Scientific American)*

PROS and CONS of Science Communication

Science communication can be perceived in many ways, which is both the benefit and drawback of this field. However, if approached in the correct manner, effective science communication ultimately proves to be more of a positive tool than a negative practice.

Pros/benefits:

- Increased public *science education*
- Potential to effect *societal change*
- Helps scientists improve their *grasp of their own field* through the development of communication materials at multiple levels
- *Inspires* future young scientists to pursue careers in science
- Develops scientists' *toolkits* by learning skills including leadership, organization, and creativity
- *Expands* science networks through interaction with more scientists who share similar or adjacent research interests

Cons/drawbacks:

- Fear of not being viewed as *professional*
- Being taken out of context
- Someone taking your ideas
- Taking valuable time needed for doing research

This page titled 6.1: Introduction is shared under a CC BY 4.0 license and was authored, remixed, and/or curated by Anna R. Schwyter & Karen L. Vaughan (UW Open Education Resources (OER)) via source content that was edited to the style and standards of the LibreTexts platform.

6.2: Activity

For the remainder of the lab period we will work on creating your own infographic focused on a specific subject or facet of soil science. In this exercise you will start by taking your 4-5 prepared facts and organizing them into an aesthetically pleasing and informative infographic created specifically for a target audience (identified before creating your infographic). 4-5 facts is just your base, and students are welcome to use up to 10 facts. We highly encourage students to incorporate graphs, brief statistics, figures, and images within the infographic. The overall goal of this exercise is to practice translating your knowledge of soil science into a brief, impactful, and accurate deliverable used to communicate your science!

Instructions for creating your infographic in-class:

a. To begin, go to canva.com

b. Students can sign up for this FREE graphic design site

c. After you are signed up type "infographic" into the search bar to bring up the infographic template

d. Once you have brought up the editable template, follow the basic steps of the program and explore what the different tools available can do.

e. It is time to create!

f. Note: not all graphics are free to use, and you won't be able to download your infographic without paying. To avoid this, find graphics that are open source.

OUTCOMES: At the end of the lab period you are required to submit a PDF of your infographic to your laboratory instructor. The TOP 3 infographics from each lab section will move on to a class-wide competition for TOP INFOGRAPHIC selected by your professor. Top infographics will be rewarded for their work!

A few tips on infographics before we get to creating: (adapted from: nielpatel.com)

a. **Create your infographic for your target audience**

b. **Keep it simple**- you only have so much space

c. **Keep it focused**- you don't need to say all the things!

d. **Show things visually**

e. **Make it easy to view** – picture quality/clarity, font size, font type, color combinations

f. **Make it a manageable length and size** – Bigger isn't always better, and vice versa.

g. **Add white space** – people's eyes need a break too.

h. **Create a killer headline** – catchy, witty, short, and to the point… and accurate!

i. **Focus on the flow** – transition smoothly between facts and images to create a story

j. **Check your facts and figures**- you only have so many, so you want to make sure they are right, otherwise there will be blaring errors and that's what will catch folks' eyes.

k. **Cite your sources**

Please read through and complete the following activity and questions. All questions should be answered and completed labs are due at the end of the laboratory period. No late work will be accepted.

1. *Describe in your own words what science communication is and how it can enhance scientific research efforts*
2. *How have you ever implemented the practice of science communication into any of your previous work or studies?*
3. *How did you find this exercise useful for communicating science?*
4. *Who is your target audience for this infographic?*
5. *What did you like about this exercise?*
6. *What didn't you like about this exercise?*
7. *If any, what other skills or outcomes would you have preferred to develop regarding the practice of science communication*

This page titled 6.2: Activity is shared under a CC BY 4.0 license and was authored, remixed, and/or curated by Anna R. Schwyter & Karen L. Vaughan (UW Open Education Resources (OER)) via source content that was edited to the style and standards of the LibreTexts platform.

CHAPTER OVERVIEW

7: Soil Chemistry

Learning Objectives

- To learn about the variety of soil colloids that exist
- To understand the fundamentals of soil charge, including isomorphic substitution and cation exchange capacity
- To become familiar with how pH and electrical conductivity affect soil functions and processes and how to measure these parameters
- To better understand the concepts and processes behind soil redox reactions

GOAL: To understand key aspects of chemical nature, properties, and reactions in the soil-environment.

7.1: Introduction

7.2: Activity 1 - Soil Colloids

7.3: Activity 2 - Soil Charge

7.4: Activity 3 - Soil Charge Calculations

7.5: Activity 4 - Soil pH and Electrical Conductivity

7.6: Activity 5 - Reduction and Oxidation Reactions

Additional resources:

- Video link: Soils Sustains Life: https://youtu.be/vDL6F6GkAzI (length 2:54)
- Video link: The Science of Soil: Why Study Soil? https://youtu.be/og3TUc9xQaE (length 4:19)

This page titled 7: Soil Chemistry is shared under a CC BY 4.0 license and was authored, remixed, and/or curated by Anna R. Schwyter & Karen L. Vaughan (UW Open Education Resources (OER)) via source content that was edited to the style and standards of the LibreTexts platform.

7.1: Introduction

Soil Chemistry is the branch of soil science that deals with the chemical composition, chemical properties, and chemical reactions in soil. The soil environment is dynamic and comprised of a heterogeneous mixture of air, water, and inorganic and organic solids. Soil chemistry is primarily concerned with the chemical reactions associated with the many phases incorporated within the soil mixture. Soil chemistry is an ever-expanding field that traditionally focused on chemical reactions that affected plant growth and nutrition, and has since expanded to include water and soil contaminants and their effects on plants, animals, and humans.

Soil is made up of inorganic and organic assemblages, in the form of solids, liquids, and gases. Elemental content varies among soil types, however, the elements found in the highest quantities are typically O, Si, Al, Fe, C, Ca, K, Na, and Mg (in order of highest to lowest natural abundance). Inorganic components of soil makeup approximately 90% of all solid components, however, soil organic matter (SOM) still plays a critical role in chemical reactions within the soil. In addition, properties such as size, surface area, and charge behavior affect the majority of the essential equilibrium and kinetic reactions and processes which occur in soils (Figure 1).

In this lab we will cover important chemical reactions in soil, the properties that affect chemical reactions in the soil, and how to measure specific chemical properties in soils.

SOIL COLLOIDS

The extremely small, colloidal particles (smaller than 0.002 mm) of clay and humus control many important chemical and physical properties of the soil. This portion of the soil is often called the "active fraction", comprised of highly reactive materials with electrically charged surfaces. The small size of colloids results in a large surface area per unit weight, and their ionic structure results in a net electrical charge.

The type, amount, and mineralogy of colloids will strongly influence most land management decisions. For example a soil that is 40% of clay that primarily consists of smectite (a 2:1 shrink-swell clay) could have limitations for constructing roads, or building foundations due to the shifting of the soil as the soil wets and dries. Such a soil could be highly productive for row crop agriculture though, due to the high amount of charge that facilitates the retention of nutrients like Ca^{2+}, K^{+}, Mg^{2+}, etc. On the contrary, a soil such as an Oxisol that has 80% clay has colloids that are primarily aluminum and iron oxides, which do not shrink or swell, and have a low amount of charge. Thus, the soil would be well suited for building foundations.

General properties of soil colloids

Size: smaller than what can be seen with a normal light microscope

Surface area: The smaller the size of the soil particles the greater the surface area. Higher surface area increases the availability of reaction sites for processes such as adsorption, catalysis, precipitation, microbial colonization, etc. Some colloids may also possess extensive internal surfaces, depending on crystalline units present.

Surface charge: colloids carry positive and/or negative electrostatic charges, whereby negative charges typically outweigh positive charges. Charge is sometimes pH dependent. Colloid charge helps to attract or repulse various substances in the soil solution or environment.

Types of soil colloids

Crystalline silicate clays: Clay types vary based on the number and combinations of structural units. The structural units are characterized by either tetrahedral units (Si^{4+}) or octahedral units (Al^{3+}, Mg^{2+}, and Fe^{2+}/Fe^{3+}) (Figure 2). Individual units link together to form “sheets” of tightly bound and tightly packed 0-Si-Al atoms, which combine to form the layers which give the clay its characteristic crystalline structure. The size and location of layer charge varies due to the process of isomorphic substitution, which occurs in the layered sheets (Figure 2). Crystalline silicate Clays are typically categorized into two categories: 1) 1:1 clays; and, 2) 2:1 clays.

1:1 Clays- (i.e. Kaolinite)

- One tetrahedron and one octahedron sheet
- Non-expanding, no shrink-swell action

- Little isomorphic substitution
- Found in highly weathered soils

2:1 Clays- (i.e. smectite, vermiculite, and mica)

- One octahedral sheet between two tetrahedral sheets
- Have a variety of shrink-swell potentials, favoring increased shrink-swell action
- Charge dominated by isomorphic substitution
- Isomorphic substitution occurs in the… octahedral (smectite), tetrahedral (mica), and tetrahedral (vermiculite)

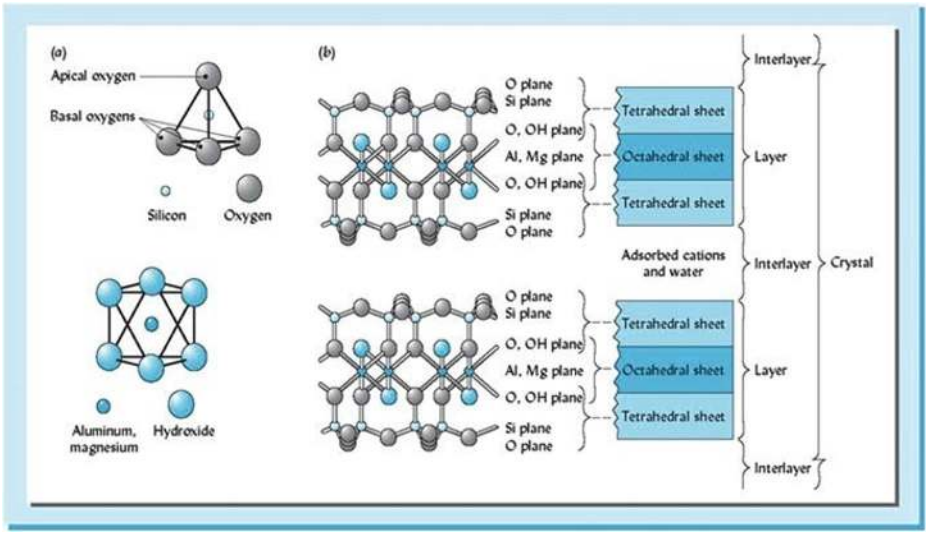

Figure 1. "The basic molecular and structural components of silicate clays" (a) (top) Si tetrahedral structure versus, (bottom) Al, Mn octahedral structure, and b) orientation of tetrahedral and octahedral sheets forming layered crystalline structure. Adapted from "The Nature and Properties of Soils" Brady and Weil, 2008.

Noncrystalline silicate clays: These clays also consist of tightly bonded Si-Al-O atoms, oriented into unordered, noncrystalline sheets. They are characterized by high water holding capacity and extremely high capacities to strongly absorb phosphate and other anions, particularly under acid conditions. Examples of noncrystalline silicate clays include, allophane and imogolite, typically found in Andisols, or soils derived from volcanic ash.

Iron and aluminum oxides: these properties are present in many soils but are highly expressed in highly weathered soils of warm, humid regions. They consist of either Fe or Al atoms combined with O atoms, with a net charge that ranges from slightly negative to moderately positive. Examples of iron oxides include crystalline goethite and soil coatings. Examples of aluminum oxides include crystalline gibbsite and soil coatings.

Organic material/humus: Organic colloids or humus, are especially important in the upper portions of a soil profile. Because these colloids are not mineral material, alternatively, they consist of complex chains and rings of carbon atoms bonded to H, O, and N. These colloids are often the smallest in size, have a net negative charge that varies with soil pH, and have a high capacity to absorb water.

SOIL CHARGE

Now that we have prefaced the basics of soil colloids, it is important to highlight some of the important processes which contribute to the potential charge of a soil. To begin, there are two kinds of charge within a soil: 1) Permanent charge and 2) Variable charge.

1. *Permanent charge:* this charge is determined from isomorphic substitution which takes place in the clay fraction of the soil between phyllosilicate layers of crystalline silicate clays.
2. *Variable charge:* this charge is predominantly pH dependent and results from reaction of OH^- associated with the following
   - Edges of clay minerals
   - Organic material
   - Aluminum and iron oxides

Isomorphic substitution

Is the process by which one element fills a position originally filled by another element of similar size (ionic radii). This process typically occurs between Si, Al, and Mg ions held within octahedral and tetrahedral structures, whereby they are replaced by a cation of similar size (Figure 3). This replacement alters the overall charge and nature of silicate clays. For example, if Mg^{2+} substitutes Al^{3+}, overall charge balances in favor of a negative charge from the presence of O, and the resulting sheet is left with a net negative charge (Figure 4).

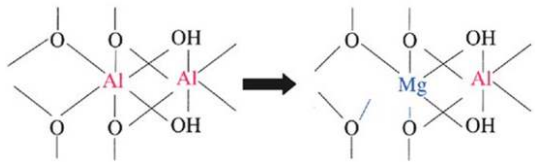

Figure 2. "Permanent charge due to isomorphic substitution" Example of isomorphic substitution whereby Mg replaces the position of Al, still maintaining crystalline structure.

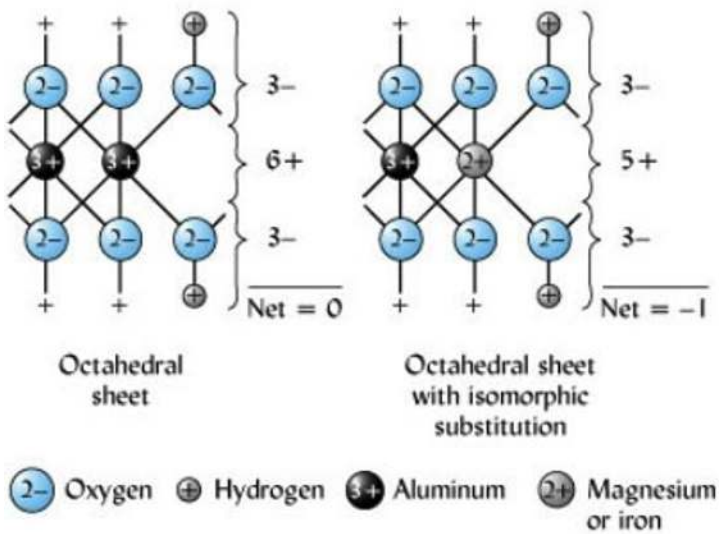

Figure 3. Charge calculations determined for the substitution of one Mg in place of an Al ion. Adapted from "The Nature and Properties of Soils" Brady and Weil, 2008.

Cation Exchange Capacity

Ion exchange is one of the most significant features of the clay and humus fractions. The capacity of the particles to attract or adsorb cations is called the cation exchange capacity (CEC). This soil property is very important for plant uptake of nutrients and buffering against soil acidification. Clay minerals and organic components of the soil have negatively charged sites which can absorb positively charged cations and hold those cations on their surfaces by electrostatic force. This ability allows the soil to serve as a storehouse of plant nutrients like potassium (K^{+}), calcium (Ca^{2+}), and magnesium (Mg^{2+}), also referred to as *base cations*. Measuring base cations in a soil will give a good idea of that soil's CEC.

Because many plant nutrients exist as cations, CEC is critical for plant growth. A soil with high clay and organic matter will have more negatively charged sites for cations and therefore have a greater CEC and are more fertile for plants. However, in an agricultural setting, crops can be grown on soils with low CEC and still be productive with amendments. The reactive exchange capacity of the soil also permits it to serve as a filter or treatment medium for land application of waste materials.

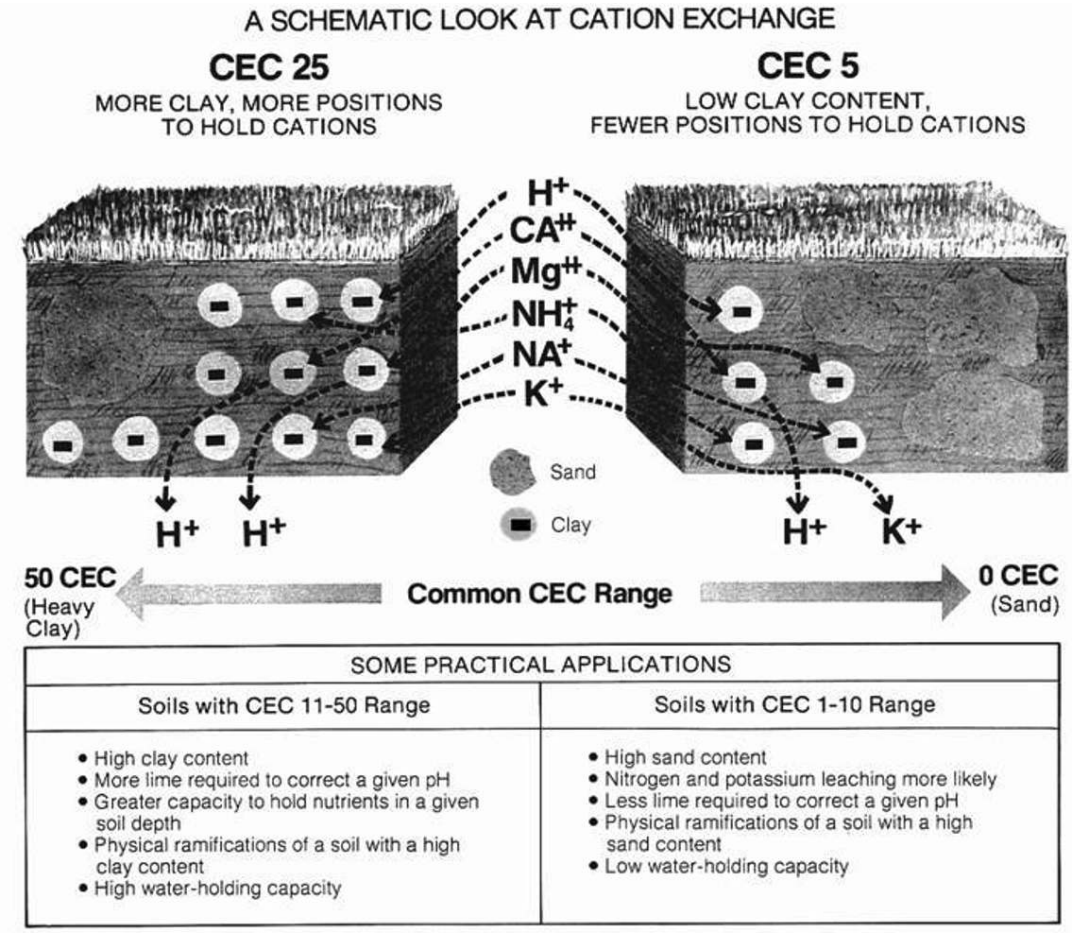

Figure 4. "A schematic look at cation exchange" by Spectrum Analytic Inc.

Determining Cation Exchange Capacity

The cation exchange capacity (quantity of cations a soil can adsorb per unit weight, CEC) can be determined using a simple displacement process (Figure 5).

1. Soil sample is first saturated with a simple cation like NH_4^+ so all the negative charge sites are occupied by NH_4^+.
2. Excess NH_4^+ (i.e., not on exchange sites) is removed by leaching with ethyl alcohol.
3. Another cation such as Ba^{2+} is used to displace all the NH_4^+. The NH_4^+ is collected in the filtrate and measured. The quantity of NH_4^+ collected from the sample is the quantity of cations that the soil can hold, i.e. CEC.

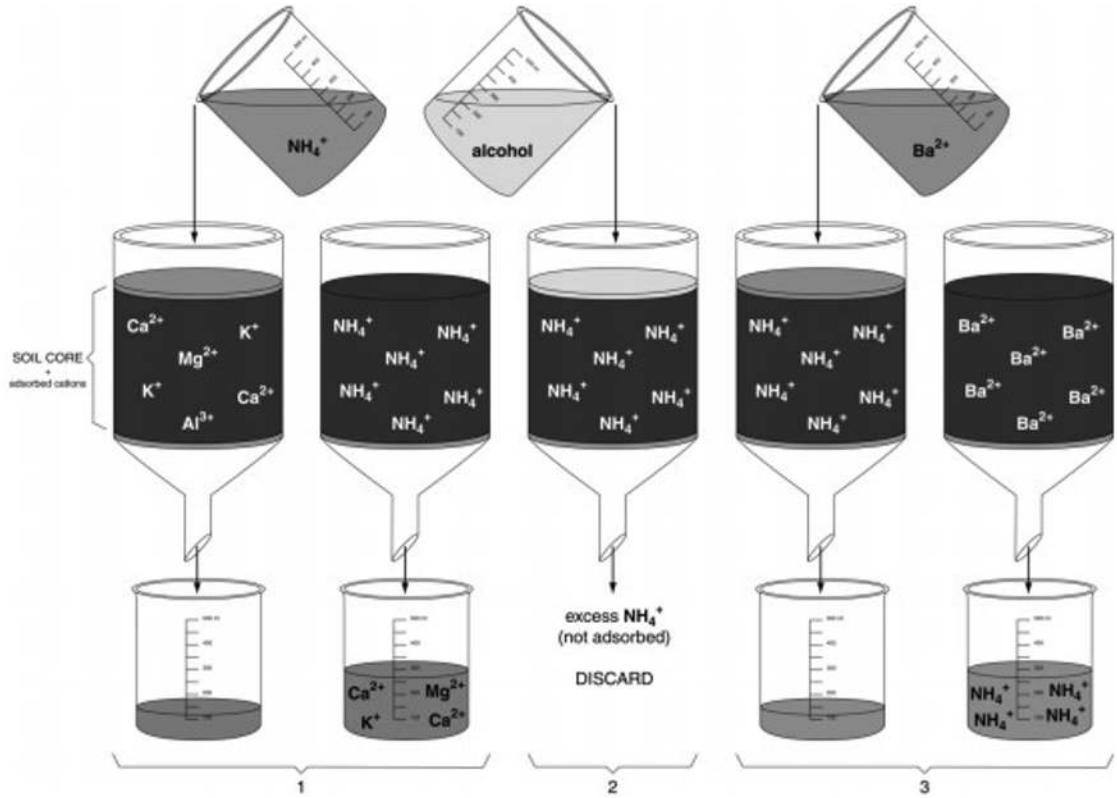

Figure 5. "Schematic of process for determining cation exchange capacity" by Colby J. Moorberg and David A. Crouse is licensed under CC by 4.0

Calculating CEC

The Sum-of-Cations Method: If you have a soil analysis where the quantities of all cations in the soil are listed, simply summing all those exchangeable quantities will yield the CEC you found in the preceding problems.

The "Mineralogy" Method: As you know from your reading and class discussion, clay minerals have a range of values for CEC. If the mineralogy of the clay fraction is known (that is, the type and amounts of each clay mineral), then the CEC can be approximated.

To make these calculations easier, Table 1 contains representative values for CEC to use in all calculations for this class unless otherwise noted. In nature, however, these soil colloids will have a range of values.

Table 1. ""Typical CEC of various soil colloids"" by Colby J. Moorberg and David A. Crouse is licensed under CC by 4.0

Mineral or colloid type	CEC of pure colloid ($cmol_c$/kg)
kaolinite	10
illite	30
montmorillonite/smectite	100
vermiculite	150
humus	200

Example: Using the mineralogy approach to CEC calculations, consider a soil having 100% clay where the clay is 100% kaolinite. The CEC would then be 10 $cmol_c$/kg. If a soil contains only 10% kaolinite (or 10 kg clay in 100 kg soil), however, this clay would contribute:

$$\text{Total CEC of the soil} = \frac{10\ \text{cmol}_\text{c}}{\text{kg clay}} \times \frac{10\ \text{kg clay}}{100\ \text{kg soil}} = \frac{1.0\ \text{cmol}_\text{c}}{\text{kg soil}}$$

Soil pH

By definition, pH = -log [H^+]. The pH of soil is a critical factor for the fate of many chemical processes and the variable charge of soil. Soil pH is also incredibly important for plant growth: certain plant essential nutrients are only available within certain pH ranges. Plant optimal pH ranges vary greatly. Some plants excel in low pHs (e.g. blueberries) while others are adapted to high pHs (e.g. asparagus) (Figure 7). For agriculture, if the soil pH is not desirable for the given crop, it can be adjusted. The addition of lime can raise the pH while adding organic matter or ammonium fertilizer can lower the pH.

Soil Electrical Conductivity

Electrical Conductivity (EC) is the measure of the amount of salts in soil, or salinity. EC varies by soil type, texture, and location (Figure 8). EC is very relevant in the Western U.S. as well as in tidal zones in coastal areas. EC affects multiple facets of soil health including soil-water balance and soil microbe activity. The negative effects on the soil-water balance can be devastating to plants: saline soils have a lower water potential than what is within plants, causing water to move from the plants to the soil. This loss of water causes drought stress to the plants. High levels of salinity are common in the West because of the drier climate. With lack of water movement through the soil profile the salts are not flushed out of the soil and accumulate near the surface. There are many ways to properly manage a soil that has an EC higher than desired, including limiting nitrogen fertilizer (which can increase salinity) as well as practicing no-till agriculture to retain soil moisture.

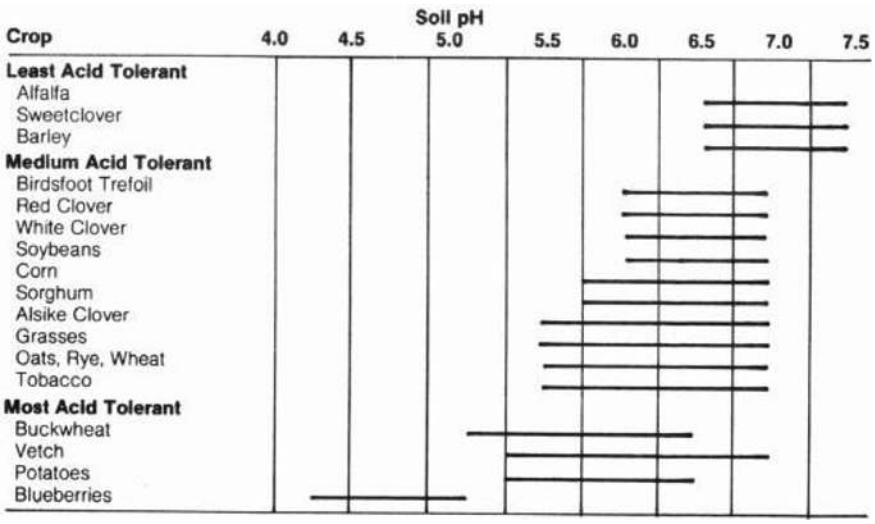

Figure 6. Mineral soil pH ranges for crops by Keith Johnson, used with written consent.

Table 2. Salinity classes and relationship between $EC_{1:1}$ to ECe values (Smith and Doran, 1996 adapted from Dahnke & Whitney, 1988).

Texture	Degree of Salinity (Salinity Classes)					
	Non-Saline	Slightly Saline	Moderately Saline	Strongly Saline	Very Saline	Ratio of $EC_{1:1}$ to ECe
$EC_{1:1}$ Method (dS/m)						
Coarse to loamy sand	0-1.1	1.2-2.4	2.5-4.4	4.5-8.9	9.0+	0.56
Loamy fine sand to loam	0-1.2	1.3-2.4	2.5-4.7	4.8-9.4	9.5+	0.59
Silt loam to clay loam	0-1.3	1.4-2.5	2.6-5.0	5.1-10.0	10.1+	0.63
Silty clay loam to clay	0-1.4	1.5-2.8	2.9-5.7	5.8-11.4	11.5+	0.71
ECe Method (dS/m)						
All textures	0-2.0	2.1-4.0	4.1-8.0	8.1-16.0	16.1+	NA

Figure 7. "EC ranges for a variety of soil textures" by USDA NRCS

REDUCTION-OXIDATION (redox) REACTIONS IN SOIL

Alternating oxidizing and reducing conditions in soils influence a number of critical chemical reactions, the potential for plant growth, soil organic matter dynamics, and the survival of organisms. The quantification of reducing soil conditions is driven by saturated soil conditions and is particularly important in the assessment of wetland function and identification of hydric soils.

The redox ladder (figure 8) serves as a useful guide indicating the hierarchy of chemical compounds used as terminal electron acceptors (TEA) during microbially mediated reduction reactions (Figure 9). The various compounds are utilized as TEAs at specific redox potential (Eh) ranges and are impacted by pH as well.

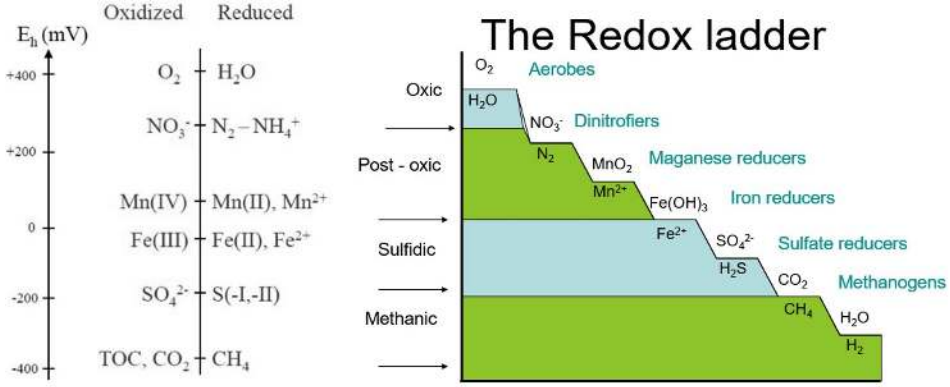

Figure 8. The redox ladder and associated redox potential (Eh) thresholds by Vaughan & Duball, 2019.

Redox Diagrams

Redox conditions in soil are represented on a Redox diagram, which displays Eh versus pH (Figure 10). By determining the pH and the Eh and finding the point of intersection on the Redox diagram one can obtain a fairly good idea about the general nature of the soil system.

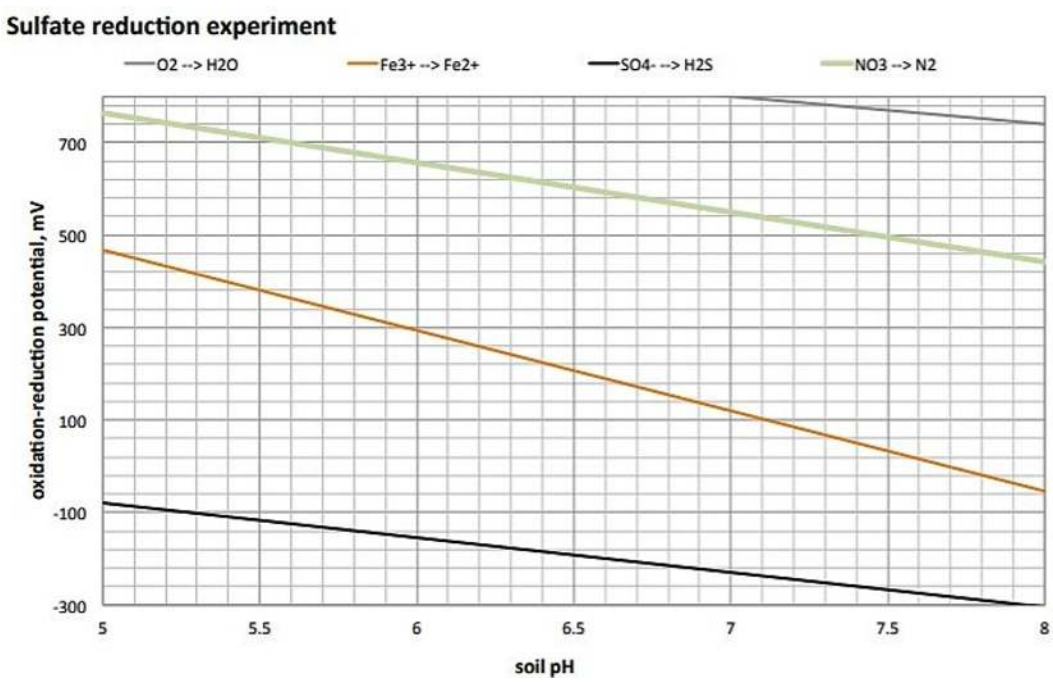

Figure 9. Redox diagram demonstrating the function of pH and redox potential on the fate of reduction for various chemical compounds. The upper right of a redox diagram represents highly oxidized conditions, while the lower left represents highly reduced conditions, by Vaughan & Duball, 2019.

Effects of reducing soil conditions on the soil environment

Anaerobic conditions can generate methane gas. The gas may be visible as entrapped bubbles in the suspension. Also, the anaerobic conditions can be appreciated by carefully detecting the nature of the system using your olfactory senses (smell). Under anaerobic conditions, microorganisms are prone to generate many organic amines (such as putrescine), which are highly odoriferous. Hydrogen sulfide (rotten egg) gas can be generated when the system becomes strongly anaerobic and most of the metal ions have been converted to FeS or FeS_2.

Sulfate reduction occurs under anaerobic conditions where the sulfate ion serves as an alternate electron acceptor replacing the normal oxygen gas molecule. Energy must be provided to the microorganisms in the form of readily available organic material, which provides the electrons in the H atoms that are never isolated as such in the reaction. The reaction may be summarized as follows:

$$SO_4^2 + 8[H^+] \rightarrow S^{2-} + 4H_2O$$

The sulfide that forms is very reactive. It forms extremely insoluble metal sulfides (iron-monosulfides (FeS) and pyrites (FeS_2)). These metal sulfides give the solution a black or dark gray appearance. Often an organic mat forms on the surface of these soils.

Please read through and complete the following activity and questions. All questions should be answered and completed labs are due at the end of the laboratory period. No late work will be accepted.

This page titled 7.1: Introduction is shared under a CC BY 4.0 license and was authored, remixed, and/or curated by Anna R. Schwyter & Karen L. Vaughan (UW Open Education Resources (OER)) via source content that was edited to the style and standards of the LibreTexts platform.

7.2: Activity 1 - Soil Colloids

Name: _____

Section: _____

Student ID#:_____

1) Fill in the blanks regarding characteristic properties of soil colloids.

Soil Colloid Type	Name one defining characteristic of this colloid	Where in the soil profile will these colloids dominate?	What soil order would contain a large amount of these colloids?
Crystalline silicate clay (1:1)			
Crystalline silicate clay (2:1)			
Noncrystalline silicate clay			
Fe and Al Oxides			
Humus			

2) Describe the major difference between a 1:1 silicate clay and a 2:1 silicate clay.

This page titled 7.2: Activity 1 - Soil Colloids is shared under a CC BY 4.0 license and was authored, remixed, and/or curated by Anna R. Schwyter & Karen L. Vaughan (UW Open Education Resources (OER)) via source content that was edited to the style and standards of the LibreTexts platform.

7.3: Activity 2 - Soil Charge

Name: _____

Section: _____

Student ID#:_____

1) The instructor has set out two samples of the same soil and placed them into leaching tubes. Into one tube the instructor will add a solution of Eosine Yellow. Eosine Yellow is a complex organic dye with a negative electrical charge, making it an anion. Into the other tube the instructor will add a solution of Methylene Blue. Methylene Blue is a complex organic dye with a positive electrical charge, making it a cation. A sufficient amount of solution will be added to allow the accumulation of about 50 mL of leachate. Observe the color of the resulting soil in each tube and the color of leachate that came through each sample of the same soil. Record your observations in the table.

	Eosine Yellow	Methylene Blue
Color of the soil		
Color of the leachate solution		
Electrical charge on the dye		

CEC experiment questions:

1. *Which dye leached through the soil and into the leachate?*
2. *What can you conclude will probably happen with other similar ions with the same electrical charge as this dye when added to the soil as fertilizers or spilled accidentally onto the soil followed by a heavy rain or water (as from irrigation or a fire truck to disperse a toxic spill of this ion)?*
3. *Which dye remained attached to the soil and consequently colored the soil?*
4. *What can you conclude will probably happen with other similar ions with the same electrical charge as this dye when added to the soil as fertilizers or spilled accidentally onto the soil followed by a heavy rain or water (as from irrigation or a fire truck to disperse a toxic spill of this ion)?*
5. *What is the name of the process demonstrated by this experiment?*

This page titled 7.3: Activity 2 - Soil Charge is shared under a CC BY 4.0 license and was authored, remixed, and/or curated by Anna R. Schwyter & Karen L. Vaughan (UW Open Education Resources (OER)) via source content that was edited to the style and standards of the LibreTexts platform.

7.4: Activity 3 - Soil Charge Calculations

Name: _____

Section: _____

Student ID#:_____

1. *A prairie soil contains 30% clay. This clay-sized fraction is dominantly montmorillonite. The soil also contains 5% humus (organic matter).*

   a. Using the mineralogy method, what is the cation exchange capacity (CEC) contributed by the clay?

   b. What is the estimated cation exchange capacity (CEC) contributed by the humus?

   c. What is the total estimated CEC of this soil?

   The following is actual laboratory data for the soil in the example:

Exchangeable Acidity	Exchangeable Bases			
$H^+ + Al^{3+}$	Ca^{2+}	Mg^{2+}	K^+	Na^+
---- $cmol_c$/kg ----		---- $cmol_c$/kg ----		
14.0	29.0	10.0	5.5	1.5

   d. Calculate the CEC from the data in the table using the sum of cations method.

This page titled 7.4: Activity 3 - Soil Charge Calculations is shared under a CC BY 4.0 license and was authored, remixed, and/or curated by Anna R. Schwyter & Karen L. Vaughan (UW Open Education Resources (OER)) via source content that was edited to the style and standards of the LibreTexts platform.

7.5: Activity 4 - Soil pH and Electrical Conductivity

Name: _____

Section: _____

Student ID#:_____

1) Measuring pH:

a. Add 5 g of each soil type into to sterile cup.

b. Add 20 mL of DI water

c. Mix the soil and water until it is a uniform slurry

d. Use pH meter and place electrode into the slurry

e. Wait until the reading stabilize

f. Record pH

g. Rinse and wipe down meter

h. Repeat process for all samples

pH Data-

Sample ID	pH

2) Measuring EC:

(Follow procedure for measuring pH)

EC Data-

Sample ID	EC

pH and EC questions:

1. *Which soil sample had the highest pH? Lowest?*
2. *What range of salinity does each soil sample meet?*
3. *If your soil had a pH of 5 what treatment needs to be done so that alfalfa can be planted?*
4. *What is the pH range for All Textures for Slightly Saline?*

This page titled 7.5: Activity 4 - Soil pH and Electrical Conductivity is shared under a CC BY 4.0 license and was authored, remixed, and/or curated by Anna R. Schwyter & Karen L. Vaughan (UW Open Education Resources (OER)) via source content that was edited to the style and standards of the LibreTexts platform.

- **Current page** is licensed CC BY 4.0. Original source: https://wyoscholar.uwyo.edu/articles/educational_resource/SOIL_2010_-_Lab_Manual_Materials/13705561.
- **7.4: Activity 3 - Soil Charge Calculations** is licensed CC BY 4.0. Original source: https://wyoscholar.uwyo.edu/articles/educational_resource/SOIL_2010_-_Lab_Manual_Materials/13705561.

7.6: Activity 5 - Reduction and Oxidation Reactions

Name: _____

Section: _____

Student ID#:_____

Your instructor has prepared a set out a suite of mesocosms, which have been incubating since the beginning of the semester with some under fully saturated conditions and some under aerobic conditions, representing two different reduction samples.

The objective of this experiment is to evaluate the redox potential (Eh) and the pH of the soil solutions that were incubated with an aerobic or an anaerobic condition during the semester.

You will conduct the following:

1. *OLFACTORY OBSERVATIONS…*
   - Carefully open the lid of the sulfate reduction jar. Do not shake or agitate the suspension.
   - Hold the jar in front of your face and use your hand to waft the air towards your nose. Smell the gases being released.
   - Record the nature of your observations.
   - OBSERVATIONS →
2. *SOIL pH MEASUREMENTS…*
   - Carefully insert the pH electrodes into the suspension in the container.
   - Measure the pH of each suspension. It will take about 20 seconds for the pH meter to stabilize each system.
   - Record the pH values for each system.

pH Measurements for →	Control:
	Organic Matter Addition
	K_2SO_4 Addition:
	OM+K_2SO_4:

In addition, your instructor has set out another suite of mesocosm experiments with indicator of reduction in soil (IRIS) tubes inserted into the soil for one month. Protocol for interpreting IRIS tubes is also on display for you to review. After interpreting the IRIS tubes please answer the following questions below:

1. Which mesocosms displayed reduction of sulfate?
2. How do you know sulfate was reduced? Please describe in detail below including the chemical reaction involved.
3. What colors indicate reduction of iron? _____ and _____.
4. When iron (Fe) is reduced it goes from _____ to _____. (form of iron)
5. Reduction of what chemical compound exemplifies the strongest reducing soil conditions? (State the oxidized and reduced forms)
6. Refer to Figure 11 to answer the following questions.
   - At the following Redox Potential (Eh) in Mv, and pH ranges, what compounds are being reduced?
     - Eh = +400, pH = 8 → _____
     - Eh = 0, pH = 6 → _____
     - Eh = -300, pH = 5 → _____
   - Who is responsible for the microbially mediated reactions at the following ranges?
     - Eh = +500, pH = 9 → _____
     - Eh = 0, pH = 9 → _____

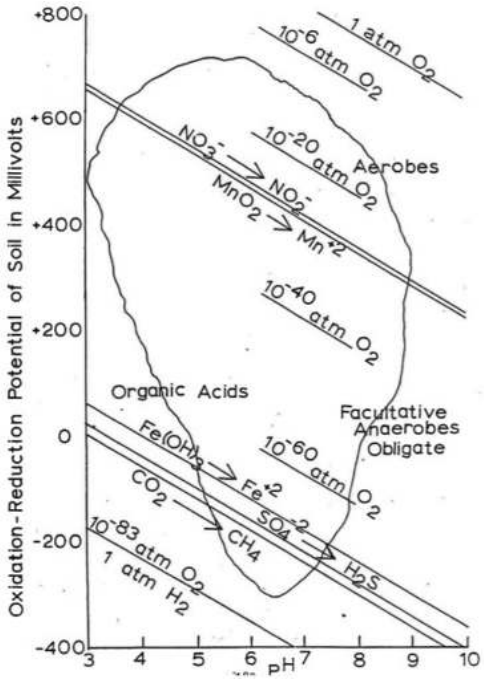

Figure 1: "Schematic of process for determining cation exchange capacity" by Colby J. Moorberg and David A. Crouse is licensed under CC by 4.0

This page titled 7.6: Activity 5 - Reduction and Oxidation Reactions is shared under a CC BY 4.0 license and was authored, remixed, and/or curated by Anna R. Schwyter & Karen L. Vaughan (UW Open Education Resources (OER)) via source content that was edited to the style and standards of the LibreTexts platform.

CHAPTER OVERVIEW

8: Soil Health & Quality

Learning Objectives

- Define soil health.
- Understand the difference between inherent and dynamic soil properties/qualities.
- Become familiar with the nutrient cycles of nitrogen, potassium and phosphorus and the carbon cycle.
- Identify how different soil management strategies can affect nutrient cycling.
- Solve fertilizer calculations for given scenarios.

GOAL: To become familiar with the importance of the many aspects of soil health and understand it as the capacity of soil to function as a vital living ecosystem.

8.1: Introduction to Soil Health

8.2: Activity 1 - Aggregate Stability

8.3: Activity 2- Nutrient Cycling and Availability

8.4: Activity 3 - Soil Nitrate

8.5: Activity 4 - Fertilizer Calculations

Additional resources:

- USDA NRCS Soil Quality Test Kit https://www.nrcs.usda.gov/wps/portal/nrcs/detail/soils/health/assessment/?cid=nrcs142p2_053873
- NRCS employee Ray Archuleta preforming slake test and infiltration test https://www.youtube.com/watch?v=CEOyC_tGH64 (video length 7:09)

This page titled 8: Soil Health & Quality is shared under a CC BY 4.0 license and was authored, remixed, and/or curated by Anna R. Schwyter & Karen L. Vaughan (UW Open Education Resources (OER)) via source content that was edited to the style and standards of the LibreTexts platform.

8.1: Introduction to Soil Health

Introduction to Soil Health

(Adapted from NRCS, 2017)

Soil health is also commonly referred to as, soil quality. As defined by the Natural Resource Conservation Service, soil health is "the continued capacity of soil to function as a vital living ecosystem that sustains plants, animals, and humans." This concept identifies the fact that only "living" things can have health, thereby stressing the concept that a **soil is a living ecosystem**. As with all living entities, including living ecosystems, the only way to maintain life is through proper management.

Soil is not simply an inert growing medium, but rather it is comprised of billions of biological organisms, ranging from microscopic to macroscopic in size. Together these organisms help to maintain the life of the soil, as well as many physical, chemical and biological factors. Therefore, soil is an ecosystem which can provide the following capabilities: (NRCS, 2017)

1. **Regulating water -** Soil helps control where rain, snowmelt, and irrigation water goes. Water and dissolved solutes flow over the land or into and through the soil.
2. **Sustaining plant and animal life -** The diversity and productivity of living things depends on soil.
3. **Filtering and buffering potential pol utants -** The minerals and microbes in soil are responsible for filtering, buffering, degrading, immobilizing, and detoxifying organic and inorganic materials, including industrial and municipal by-products and atmospheric deposits.
4. **Cycling nutrients -** Carbon, nitrogen, phosphorus, and many other nutrients are stored, transformed, and cycled in the soil.
5. **Physical stability and support -** Soil structure provides a medium for plant roots. Soils also provide support for human structures and protection for archeological treasures.

The capabilities of a soil are determined by both inherent and dynamic properties/qualities within the soil. **Inherent soil quality** is, "a soil's natural ability to function." An example of an inherent soil property/quality is how a sandy texture soil drains faster than a clayey texture soil, or how a deep soil has more space for root growth compared to a soil with bedrock at or near the surface. Essentially the idea behind inherent properties/qualities is that these characteristics do not change easily. On the contrary, **dynamic soil quality** is, "how soil changes depending on how it is managed." Management decisions and efforts can affect factors such as the amount of soil organic matter, soil structure, and water and nutrient holding capacity. Thus, dynamic soil quality is directly affected by inherent soil quality.

One major goal of soil health is to manage the soil in a way that enhances or improves soil function. It is important to understand that soils wil respond differently to management depending on inherent soil properties, and so how these properties vary across the surrounding landscape should be taken into consideration. Another core goal of soil health is to assess and manage soil so that it functions optimal y for current and future use. Monitoring changes in soil health is critical for determining sustainable soil management and practices.

Aggregate Stability

A soil with strong aggregates generally has adequate biological activity, organic matter, and nutrient cycling present. When soil aggregates are weak, it may be a sign of degradation.

Leaving soil vulnerable to greater risk of wind and water erosion, and impeding infiltration and root growth. Aggregation is especially important for survival of biological soil communities and will affect the amount of pore space between the soil particles, therefore also impacting bulk density, CEC, and many other dynamic soil properties.

Soil particles form aggregates as a product of cementing agents in the soil including clay content, adsorbed cations such as calcium and magnesium, and iron oxide content. Expansion and contraction of clay particles as they become moist and then dry can shift and crack the soil mass and create aggregates or break them apart. Calcium, magnesium, iron, and aluminum stabilize aggregates via organic matter sorption. In contrast, aggregate stability decreases with increasing amounts of exchangeable sodium: dispersion is promoted when too many sodium ions accumulate between soil particles.

Tilling a soil can both promote and destroy soil aggregates. If the soil is at an appropriate moisture level, tillage can break large clods into natural aggregates, creating a loose, porous condition that is conducive to the growth of young roots and seedlings, as

well as incorporating organic amendments into the soil and killing weeds. However, over many years, tilling practices can increase the oxidative loss of soil organic matter, weakening soil aggregates. If tillage is carried out when soil is too wet, soil aggregates can be crushed or smeared, resulting decreased macro porosity and creation of ponding conditions.

One method to determine if a soil has stable aggregates is to perform a slaking test, which is recommended by the USDA Natural Resources Conservation Service.

NUTRIENT CYCLING

There are several plant-available nutrients that are important to the overall health of a soil. The three major nutrients of importance are N, P, and K. Nutrients occur naturally in soils in mineral form, through biological inputs, atmospheric deposition, and the application of fertilizers. Nutrients are lost from systems through processes like runoff, water solubility, plant uptake and leaching. When managing a soil for plant production, it is important to understand nutrient cycles, availability, and potential for loss.

The Nitrogen Cycle

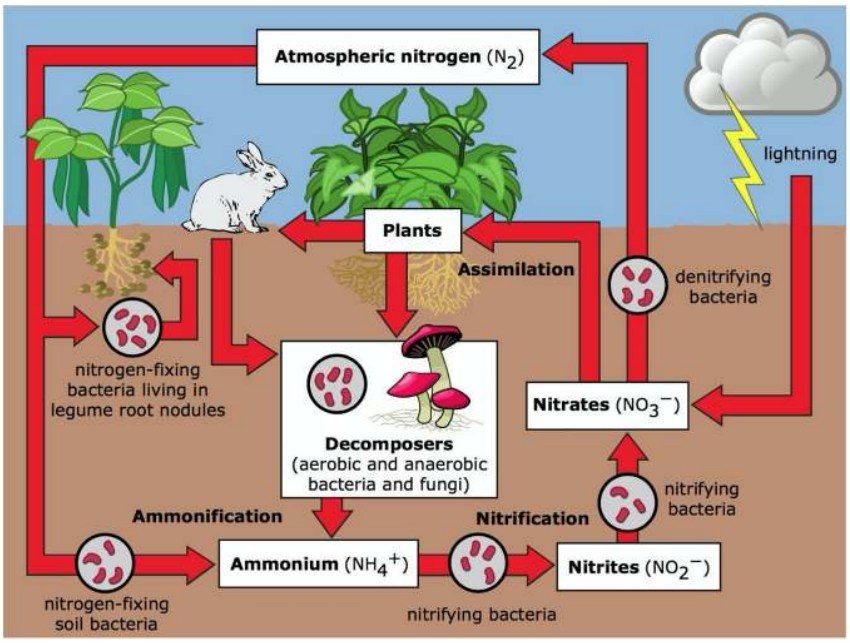

Figure 1: The Nitrogen Cycle by Johann Dréo, CC BY-SA 3.0

Nitrification is the oxidation of reduced forms of N, typically ammonium (NH_4^+), via nitrite (NO_2), to nitrate (NO_3^-). The process begins with autotrophic and chemolithotrophic bacteria oxidizing ammonium generated by organic matter mineralization and fertilizer addition, producing nitrate and acid, leading to soil acidification. The process of nitrification determines the relative amounts of different inorganic N sources available for plant and crop growth and is responsible for significant loss of added N fertilizer.

Denitrification involves the reduction of nitrate to nitrite, nitric oxide, nitrous oxide and nitrogen gas. This process is catalyzed by bacteria, archaea and fungi, and is essential for returning N to the atmosphere.

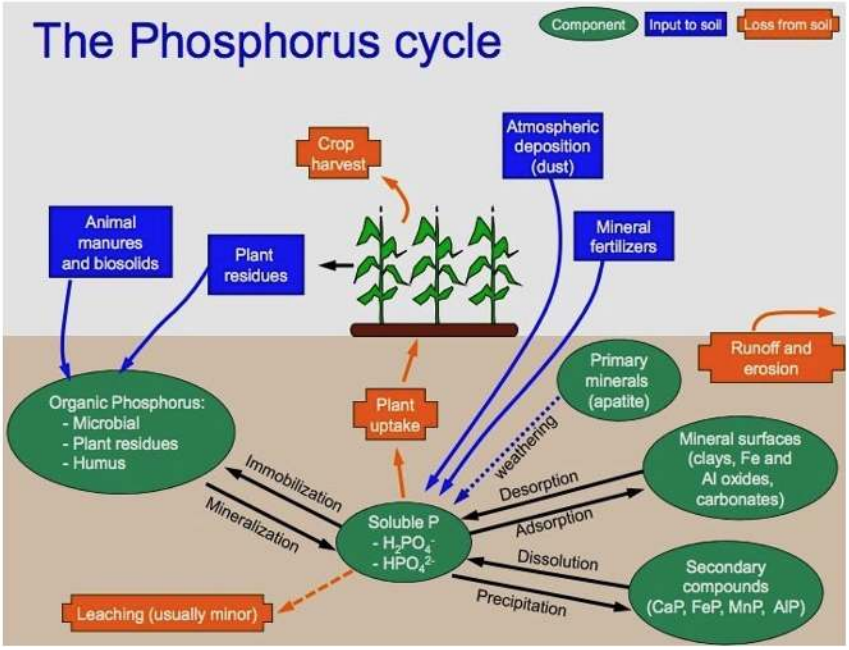

Figure 2: The P Cycle Welcome1To1The1Jungle at English Wikipedia, Phosphorus Cycle copy, CC BY 3.0

Compared to other macronutrients, like S and Ca, the concentration of **phosphorus** in the soil solution is very low, generally ranging from 0.001 mg/L in infertile soil to 1 mg/L in heavily fertilized soils. Plant roots absorb P dissolved in soil solution, mainly as phosphate ions (HPO_4^{2-} and H_2PO_4), determined by the soil pH. In strongly acid soils (pH 4 5.5), $H_2PO_4^{2-}$ dominates, while alkaline soils contain mostly HPO_4^{2-}. Phosphorus is lost from the soil by plant removal, erosion of P-carrying soil particles, P dissolved in surface runoff water and leaching to groundwater. Additions of P to the soil from the atmosphere are smal but may balance losses in undisturbed ecosystems. For optimal crop production, input from fertilizer to exceed the removal in crop harvest may be required. Phosphorus held in organic forms can be **mineralized** and **immobilized** by the same general processes that release N and C from SOM: immobilization and mineralization. [1] These processes are influenced by the same factors that control general decomposition of SOM: temperature, moisture, and tillage.

[1] Net immobilization of soluble P is likely to occur if residues added to the soil have a C/P ratio that is greater than 300:1, while net mineralization is likely if the ratio is below 200:1.

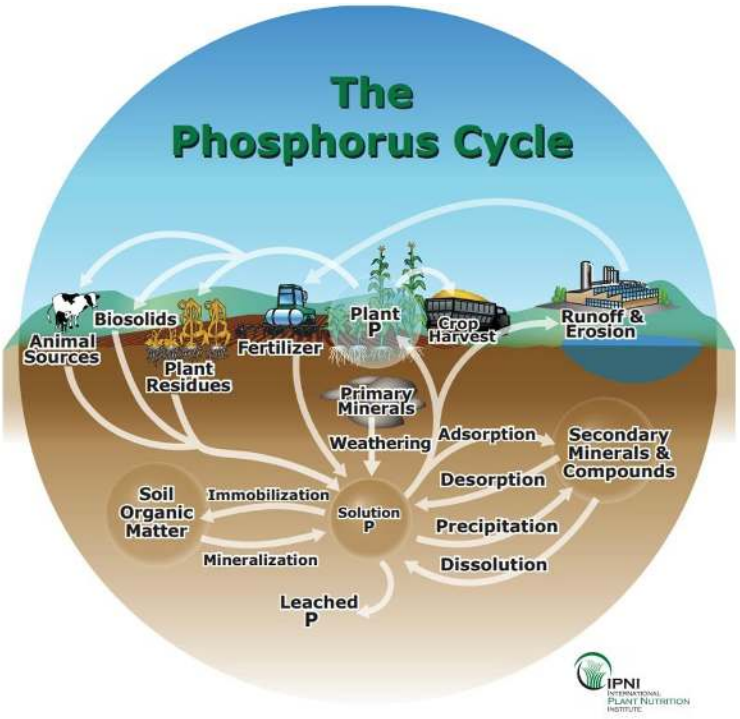

Figure 3: The Potassium Cycle

In contrast to phosphorus, **potassium** is found in comparatively high levels in most mineral soils, yet the quantity of K held in an easily exchangeable condition is often very small. However, over time K can be released to exchangeable and dissolved forms in the soil solution and can be quickly taken up by plants.

Potassium is readily lost by leaching, which can be reduced by increasing the cation exchange capacity (CEC) of the soil.[2] Liming an acidic soil to raise pH can reduce the leaching losses as wel . Plants take up very large amounts of K so biomass removal is another source of K loss from soils. This situation is increased by **luxury consumption**, or the tendency of plants to take up soluble potassium in excess if sufficiently large quantities are present.

[2] CEC is the attraction of positively charged potassium ions to the negatively charged cation exchange sites on clay and organic matter.

Forms of potassium in soils, as shown in the graphic above, include K in primary mineral structure (unavailable to plant uptake), nonexchangeable K in secondary minerals & compounds (slowly available), and exchangeable K+ on soil colloids and K2O soluble in water (readily available, only 1-2% of total soil potassium).

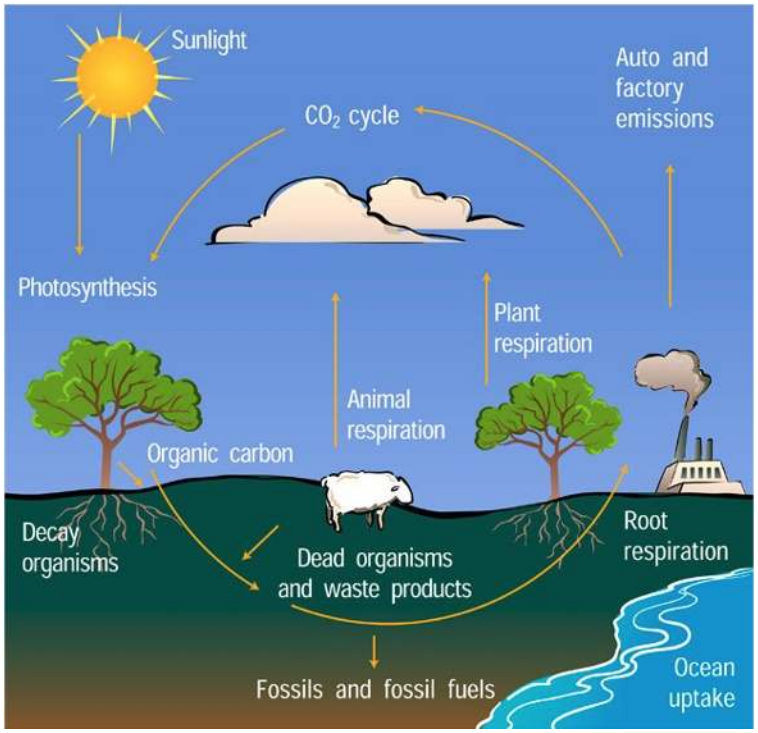

Figure 4: *"The Carbon Cycle" by University Corporation for Atmospheric Research*

The **carbon cycle** illustrates the role of soil in the global C cycle. There is more C stored in soil than in the atmosphere and above-ground biomass combined! Soil C is in the form of organic compounds originally created through photosynthesis, in which plants convert atmospheric CO_2 into plant matter, and enter the soil system as plants and animals die and decompose. Soil organisms consume the organic matter extracting energy and nutrients and releasing water, heat, and CO_2 back into the atmosphere. If organic matter is added to the soil at a faster rate than organisms convert it to CO_2, C will gradually be removed from the atmosphere and sequestered in the soil.

Cultivation aerates the soil, triggering increased biological activity, and therefore rapid decomposition, loss of SOM and the release of CO_2 into the atmosphere. Most soil C losses occur in the first several years after cultivation begins, and currently farmers and scientists are interested in reversing that effect by increasing C stored in the soils through management. (Source: NRCS East National Technology Support Center)

NUTRIENT AVAILABILITY

In addition to nutrient cycling, the actual availability of those nutrients to the plants is critical to consider when assessing soil health. Certain nutrients are only available under specific soil conditions. Soil pH is especially important when it comes to nutrient availability. Consider the following figure:

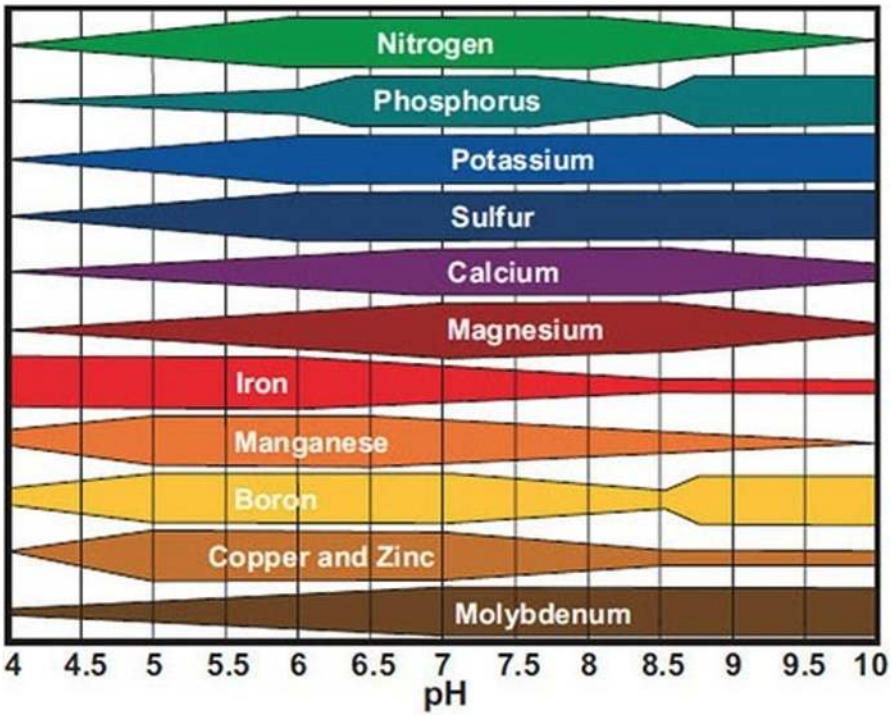

Figure 5: Nutrient availability (Source: Rough Brothers Inc.)

The width of the bar indicates the relative range of availability for each nutrient at various pH levels. Thicker bar widths reflect increased availability, and thinner sections of the bar reflect conditions at which nutrient availability is decreased.

Read through and complete the following activity and questions. All questions should be answered and completed labs are due at the end of the laboratory period. No late work will be accepted.

This page titled 8.1: Introduction to Soil Health is shared under a CC BY 4.0 license and was authored, remixed, and/or curated by Anna R. Schwyter & Karen L. Vaughan (UW Open Education Resources (OER)) via source content that was edited to the style and standards of the LibreTexts platform.

- **Current page** is licensed CC BY 4.0. Original source: https://wyoscholar.uwyo.edu/articles/educational_resource/SOIL_2010_-_Lab_Manual_Materials/13705561.
- **8: Soil Health & Quality** is licensed CC BY 4.0. Original source: https://wyoscholar.uwyo.edu/articles/educational_resource/SOIL_2010_-_Lab_Manual_Materials/13705561.

8.2: Activity 1 - Aggregate Stability

Slake Test

1. Carefully select one in-tact soil aggregate from the available soil.
2. Place the soil aggregate on the sieve.
3. Fill the beaker with approximately 1.5 inches of water, or so that the soil aggregate will be just immersed in water when lowered into the beaker.
4. Lower the sieve into the beaker of water. Observe the soil aggregate for 5 minutes and keep track of the timing of structural loss. Refer to the stability class table below to determine class 1 and 2.
5. Once stability class 1 and 2 are determined, raise the sieve + aggregate out of the water for one second, and immerse again for another second.
6. Repeat immersion 4 times. Refer to the stability class table below to determine and record stability classes 3 through 6.

Table 1. Stability class table (Source: USDA NRCS Soil Quality Test Kit)

Stability class	Criteria for assignment to stability class (for "Standard Characterization")
0	Soil too unstable to sample (falls through sieve).
1	**50 %** of structural integrity lost within **5 seconds** of insertion in water.
2	**50 %** of structural integrity lost **5 - 30 seconds** after insertion.
3	**50 %** of structural integrity lost **30 - 300 seconds** after insertion or **< 10 %** of soil remains on the sieve after 5 dipping cycles.
4	**10 - 25%** of soil remaining on sieve after 5 dipping cycles.
5	**25 - 75%** of soil remaining on sieve after 5 dipping cycles.
6	**75 - 100%** of soil remaining on sieve after 5 dipping cycles.

Questions

1. Aggregates of soils high in organic matter are more stable than are those low in OM. Which soil aggregates fall apart when wetted, and which will maintain their stability?
2. Discuss the positive and negative impacts of tillage on soil structure. What is a physical consideration in deciding whether to utilize this practice on agricultural land?
3. What are 3 management strategies to support and promote soil aggregation?

This page titled 8.2: Activity 1 - Aggregate Stability is shared under a CC BY 4.0 license and was authored, remixed, and/or curated by Anna R. Schwyter & Karen L. Vaughan (UW Open Education Resources (OER)) via source content that was edited to the style and standards of the LibreTexts platform.

- **8: Soil Health & Quality** is licensed CC BY 4.0. Original source: https://wyoscholar.uwyo.edu/articles/educational_resource/SOIL_2010_-_Lab_Manual_Materials/13705561.
- **Current page** is licensed CC BY 4.0. Original source: https://wyoscholar.uwyo.edu/articles/educational_resource/SOIL_2010_-_Lab_Manual_Materials/13705561.

8.3: Activity 2- Nutrient Cycling and Availability

Fill in the following information pertaining to the nutrient cycles provided previously-

Nutrient Cycle	Nutrient Inputs	Nutrient Losses	Is weathering a factor? (Y/N)	Is soil organic matter a factor? (Y/N)	Name the plant-available form
N					
P					
K					

1. How does CEC affect the cycling processes of P and K?
2. Name one soil management strategy used to decrease the following scenarios:
    1. Volatilization of N:
    2. Runoff of P inputs from manure:
    3. Leaching of N, P, or K:
3. How does nutrient cycling contribute to overall “soil health”?
4. What are two techniques to increase soil C sequestration?
5. Name two techniques to reduce P losses to water.
6. Which soil, a sandy loam or clay loam, would have a larger buffering capacity for potassium? Why?

Fill in the following information pertaining nutrient availability and pH

Nutrient	pH range most available	pH range least available
N		
P		
K		
S		
Fe		
Ca		

This page titled 8.3: Activity 2- Nutrient Cycling and Availability is shared under a CC BY 4.0 license and was authored, remixed, and/or curated by Anna R. Schwyter & Karen L. Vaughan (UW Open Education Resources (OER)) via source content that was edited to the style and standards of the LibreTexts platform.

- **8: Soil Health & Quality** is licensed CC BY 4.0. Original source: https://wyoscholar.uwyo.edu/articles/educational_resource/SOIL_2010_-_Lab_Manual_Materials/13705561.
- **Current page** is licensed CC BY 4.0. Original source: https://wyoscholar.uwyo.edu/articles/educational_resource/SOIL_2010_-_Lab_Manual_Materials/13705561.

8.4: Activity 3 - Soil Nitrate

Name: _____

Section: _____

Student ID#:_____

Source: NRCS Soil Quality Test Kit Guide, Ch 7

At home before lab:

1. Collect approximately ½ cup of soil from a garden or farm. Make sure to sample only to a 0-3inch depth. To collect a representative sample, collect three samples across the field to capture variability. Determine the texture of your soil sample and record it.

Materials needed to measure soil nitrate:

- 1/8 cup soil collected by student prior to lab
- Filter paper
- 120-mL plastic container with lid
- Eye dropper
- Nitrate/nitrite test strips
- Stopwatch or timer
- Distilled water

Procedure (in lab)

1. Familiarize yourself with the directions on the side of the bottle of nitrate strips.
2. Prepare soil-water sample
    1. Thoroughly mix soil sample before taking 2 tablespoon sub-sample and placing in plastic container. Record weight of subsample.
    2. Add 30 mL of distilled water to the soil subsample, creating a 1:1 soil to water ration on a volume basis
    3. Put the lid on the container and shake vigorously 25 times.
3. Fold filter paper in half (semi-circle), the fold again into a quarter-circle.
4. Insert filter paper into subsample
    1. Open filter paper into a cone shape and push it quickly into the container with the soilwater mixture until it touches the bottom of the container. Wait for an eye dropper-full of the solution has seeped through to the inside of the filter paper.
5. Place drops on Nitrate Strips
    1. Using the eye dropper and one nitrate/nitrite test strip, place 1 or 2 drops of the filtered solution on each of the strip's two pads. **Note the time**.
    2. **Note**: one pad measures the amount of nitrite and the other measures the amount of nitrite and nitrate combined. Nitrite rarely occurs in measurable amounts in the soils, so nitrite readings from the test strips are not recorded.
6. Measure and record nitrate
    1. Align the nitrate/nitrite test strip with the bottom of the bottle with your thumb corresponding to the diagram on the bottle.
    2. After 60 seconds, compare the first pad furthest from your thumb) along the nitrate scale and estimate the amount according to the degree of color change. Record that value on the worksheet in ppm. This is an estimate of the nitrate-N concentration in the solution.

Calculations:

Estimated (lb NO_3-N/acre)=

$$\frac{(\text{ppm extract } NO_3 - N) \times (\text{depth of soil sampled in cm}) \times \text{bulk density} \times 0.89}{10}$$

Exact (lb NO_3-N/acre)=

$$\frac{(\text{ppm } NO_3 - N) \times (\text{volume water used}) \times (\text{depth of soil sampled, cm}) \times \text{bulk density} \times 0.89}{(\text{dry weight of soil}) \times 10}$$

Volume of water used = 30mL + [dry weight of soil x soil water content (g/g)]

**ppm in extract = lb NO_3-N/acre / 43.6 = lbs/1000 sq ft

Note: for garden topsoil, bulk density can be assumed to be 1.1 g/cm^3 and 1.5 g/cm^3 for subsoil. For all other soil textures, see table below.

Table 1. Soil bulk density according to texture

Soil Textures	***Avg bulk density (g/cm3)***
Organic matter	*0.22*
Sand	*1.56*
Loamy sand	*1.54*
Sandy loam	*1.5*
Loamy sand	*1.45*
Silt loam	*1.2*
Sandy clay loam	*1.63*
Silty clay	*1.55*
Clay loam	*1.45*
Silty clay loam	*1.4*

Note: The maximum nitrate-N reading on the nitrate/nitrite test strip container is 50 ppm. If the sample reading falls into the 50 ppm category, the sample can be diluted to get a better estimate of the actual amount over 50 ppm. To dilute the sample, fill the eye dropper with filtered solution and place five drops in a plastic container. Add five drops of distilled water; mix gently by swirling the container. Take a reading with a new test strip as stated in Step 4. Multiply the estimated nitrate-N in ppm by 2 before using the calculations. If the nitrate reading falls into the category of 50 ppm again, repeat the dilution steps, and multiply the estimated nitrate-N in ppm by 4.

Soil sample site description	
Soil sample texture	
Bulk Density	
Soil NO_3-N ppm (est.)	
Estimated Soil NO_3-N (lb NO_3-N/acre)	
Exact Soil NO_3-N (lb NO_3-N/acre)	

N-Availability Questions

1. Using Table 2, determine three vegetables that would have soil-N requirements met based on your soil sample.
2. Compost might typically contain about 1% total N, but only 10% of that becomes available in the first year. So typical compost would contain 0.1% NO_3-N, meaning about 1000 lb of compost is needed for each lb of N to be added, and substantially increase SOM content. Explain how compost can provide a supply a slow release of nutrients and long-term benefits to soil health.

Table 2. Nutrient requirements of common vegetables

Nutrient requirements of common vegetables									
Vegetable	Nitrogen (N)			Phosphorus (P)			Potassium (K)		
	High	Med	Low	High	Med	Low	High	Med	Low
Asparagus	x				x		x		
Beans			x		x	x			x
Beets		x						x	
Broccoli		x		x			x		
Brussels Sprouts		x		x			x		
Cabbage		x		x			x		
Carrots		x		x	x		x	x	
Cauliflower		x							
Celery	x			x			x		
Corn		x		x	x			x	
Cucumbers		x						x	
Eggplant		x		x			x		
Horseradish		x			x			x	
Kale		x			x			x	
Lettuce		x		x	x		x	x	
Onions		x			x			x	
Parsnips		x			x			x	
Peas			x			x			x
Peppers		x		x			x		
Potatoes		x		x			x		
Pumpkins		x		x			x		
Radishes		x			x			x	
Rutabaga			x		x			x	
Squashes		x		x			x		
Swiss Chard		x			x			x	
Tomatoes		x			x			x	
Turnips		x		x	x		x	x	
Soil nutrient required for veggies with high, medium, and low requirements:	Nitrogen (N)			Phosphorus (P)			Potassium (K)		
High (H)	> 1.5kg per 100m sq			> 0.4kg per 100m sq			> 2.0kg per 100m sq		
Medium (M)	0.5-1.5kg per 100m sq			0.2-0.4kg per 100m sq			1.0-2.0kg per 100m sq		
Low (L)	< 0.5kg per 100 m sq			<0.2kg per 100 m sq			< 1.0kg per 100 m sq		
High (H)	**> 3 lbs per 1000 sq ft.**			**> 0.8 lbs per 1000 sq ft.**			**> 4 lbs per 1000 sq ft.**		
Medium (M)	**1-3 lbs per 1000 sq ft.**			**0.4-0.8 lbs per 1000 sq ft.**			**2-4 lbs per 1000 sq ft.**		
Low (L)	**< 1 lb per 1000 sq ft.**			**< 0.2 lbs per 1000 sq ft.**			**< 2 lbs per 1000 sq ft.**		

This page titled 8.4: Activity 3 - Soil Nitrate is shared under a CC BY 4.0 license and was authored, remixed, and/or curated by Anna R. Schwyter & Karen L. Vaughan (UW Open Education Resources (OER)) via source content that was edited to the style and standards of the LibreTexts platform.

- **Current page** is licensed CC BY 4.0. Original source: https://wyoscholar.uwyo.edu/articles/educational_resource/SOIL_2010_-_Lab_Manual_Materials/13705561.
- **8: Soil Health & Quality** is licensed CC BY 4.0. Original source: https://wyoscholar.uwyo.edu/articles/educational_resource/SOIL_2010_-_Lab_Manual_Materials/13705561.

8.5: Activity 4 - Fertilizer Calculations

Name: _____

Section: _____

Student ID#:_____

Additions of fertilizer are important for maintain ideal soil health in agricultural management. Please complete these calculations to determine the amount of N, P and K in fertilizers.

The following conversion factors and units equivalencies will be useful to complete the fertilizer problems.

- lb P = lb P_2O_5 × 0.44
- lb P_2O_5 = lb P × 2.29
- lb K = lb K_2O × 0.83
- lb K_2O = lb K × 1.21
- 1 ton = 2000 lb
- 1 ac = 43,560 ft^2

Determining the amount of N, P, K in fertilizers

You have a 50 lb bag of granular fertilizer with a label that reads 15-10-10. The grade is 15-10-10, which is the percentage by weight of N, P as P_2O_5, and K as K_2O. This fertilizer contains 15% by weight N, 10% by weight P_2O_5, and 10% by weight K_2O. We want to know the following:

1. How many lbs of N are in the bag? Of the 50 lb of fertilizer in the bag, we know that 15% of that is N. How many lbs of P_2O_5 are in the bag? How many lbs of K_2O?
2. How many lb of P are in the bag?
3. How many lb of K are in the bag?

Calculate:

1. How much N is in a 50 lb bag of 12-22-18?
2. How much P_2O_5 is in a 40 lb bag of 0-46-0?
3. How much K_2O is in a 70 lb bag of 12-22-18?
4. How much N is in a 30 lb bag of 0-46-0?
5. How much N is in a ton of DAP (18-46-0)?
6. How much P is in a ton of DAP (18-46-0)?

Calculating the amount of fertilizer needed to supply a certain amount of N, P_2O_5, or K_2O.

When we calculate the amount of fertilizer needed to supply a certain amount of N, P_2O_5, or K_2O we need to know:

1. How much N, P_2O_5, or K_2O is needed per unit area (e.g., 1,000 square feet, acre, etc.)
2. The analysis (grade) of the fertilizer (e.g., 10-10-10, 0-46-0, etc.)
3. How much area we need to fertilize.
4. For manure applications, you need to know the amount of N that will be available during the growing season. Rule of thumb is 60%.

You need to apply 2 lbs of N per 1,000 square feet. You have a 30-0-0 grade fertilizer available for application. The area you need to fertilize is 150,000 square feet. How much fertilizer do you need to apply?

Step 1. Determine the rate of fertilizer needed.

Step 2. Determine the fertilizer analysis (grade).

Step 3. Calculate how much fertilizer you need per 1,000 square feet.

Divide the fertilizer application rate by 0.30 (30%):

Step 4. Calculate how much fertilizer is needed to cover the required area.

We need to fertilize a total of 150,000 square feet (given in the problem), which means that we multiply by the amount of fertilizer needed to apply 2 lb N to 1000 sq ft. by 150. (Note: 150 comes from dividing 150,000 sq ft/1000 sq ft):

Calculate:

1. You need to apply 2 lbs of N per 1,000 square feet. You have a 15-10-10 fertilizer available, and the total area to be fertilized is 3 acres. How much fertilizer will you need? (Hint: Don't forget to convert sq. ft. to acres!)

This page titled 8.5: Activity 4 - Fertilizer Calculations is shared under a CC BY 4.0 license and was authored, remixed, and/or curated by Anna R. Schwyter & Karen L. Vaughan (UW Open Education Resources (OER)) via source content that was edited to the style and standards of the LibreTexts platform.

CHAPTER OVERVIEW

9: Field Lab

Learning Objectives

- Know and understand the five soil-forming factors and how they influence the formation of local soils.
- In the field, determine the soil properties of texture, structure, color, pH, slope %, slope position, water runoff class, and water permeability.
- Learn the major properties of cambic, calcic, and argillic diagnostic horizons.

GOAL: To perform a soil morphological description in the field

9.1: OVERVIEW
9.2: Climate
9.3: Relief
9.4: Time
9.5: Soil Classification
9.6: Soil Orders
9.7: Slope and Runoff
9.8: Soil Permeability
9.9: Laramie's Local Soils
9.10: Activity 1 - Soil Formation

Additional resources:

- Field Book for Describing and Sampling soils (aka the RED BOOK) https://www.nrcs.usda.gov/Internet/F...2p2_052523.pdf
- Soil data explorer available from UC Davis https://casoilresource.lawr.ucdavis.edu/gmap/

This page titled 9: Field Lab is shared under a CC BY 4.0 license and was authored, remixed, and/or curated by Anna R. Schwyter & Karen L. Vaughan (UW Open Education Resources (OER)) via source content that was edited to the style and standards of the LibreTexts platform.

9.1: OVERVIEW

Soils occur in definite patterns as a consequence of the five soil-forming factors. Short distance changes in the soils are related primarily to changes in topography and parent material.

This page titled 9.1: OVERVIEW is shared under a CC BY 4.0 license and was authored, remixed, and/or curated by Anna R. Schwyter & Karen L. Vaughan (UW Open Education Resources (OER)) via source content that was edited to the style and standards of the LibreTexts platform.

9.2: Climate

Climate as a soil-forming factor helps determine soil differences on a regional scale (e.g. arid desert vs. humid forest ecosystem) or on a local level (micro-climatic differences). The important components of climate influencing soil formation include precipitation and temperature. As precipitation increases from one locale to another, more water is available to move downward through the soil profile. As water percolates downward (called leaching), water-soluble soil constituents such as soluble salts (bicarbonates, chlorides, nitrates) are translocated from upper soil horizons and are moved deeper into the soil profile.

Other materials including clay minerals do not dissolve in water, but the clay particles can be suspended in the soil solution and may leach into subsoil horizons. The greater the amount of precipitation, the deeper these dissolved and suspended materials are leached. The consequences of leaching include a lower pH (greater acidity), fewer basic cations (Ca^{2+}, Mg^{2+}, K^{+}, Na^{+}), and a lower nutrient content. As a result of variations in rainfall, little leaching occurs in desert soils while extensive leaching occurs in humid forest soils.

Soil temperature regulates the amount of evapotranspiration. The higher the temperature, the greater the amount of evapotranspiration. In hot, dry regions, any precipitation (rainfall) added to the soil may quickly evaporate into the atmosphere. In cool, moist regions, precipitation accumulates in the soil and leaching results. If two regions have the same amount of precipitation, the region having the lower soil temperatures will have more "effective" precipitation and soils will be more highly leached in the cooler region. On a local scale in the Northern Hemisphere, this concept explains the differences between soils on north-facing slopes compared with those on south-facing slopes. The soils on the north-facing slopes receive less direct solar radiation (lower temperatures, less evaporation). These soils on north-facing slopes are more highly weathered, deeper, and subject to greater leaching than are the soils on the south-facing slopes where the microclimate is warmer and drier.

Temperature regimes:	**Moisture regimes:**
Gelic: < 0 ºC	*Aquic:* (or Perudic): Saturated with water long enough to cause oxygen depletion
Cryic: 0-8 ºC (cold summers)	*Udic:* Humid or subhumid climate
Frigid: 0-8 ºC (warm summers)	*Ustic:* Semiarid climate
Mesic: 8-15 ºC	*Aridic* (or Torric): Arid climate
Thermic: 15-22 ºC	*Xeric:* Mediterranean climate (cool, moist winters and warm, dry summers)
Hyperthermic: >22 ºC	

This page titled 9.2: Climate is shared under a CC BY 4.0 license and was authored, remixed, and/or curated by Anna R. Schwyter & Karen L. Vaughan (UW Open Education Resources (OER)) via source content that was edited to the style and standards of the LibreTexts platform.

9.3: Relief

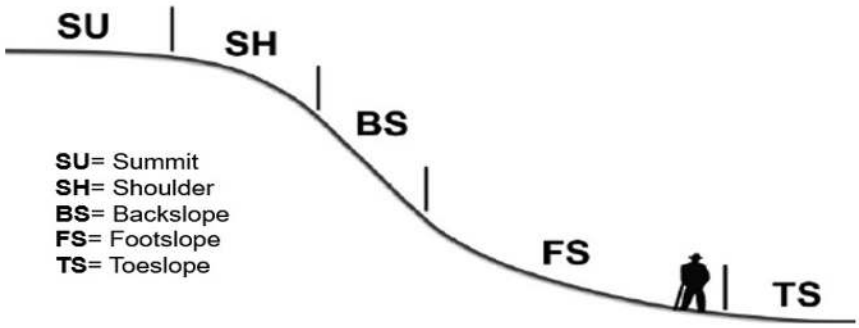

Hillslope positions across a landscape Wysocki et al., 2000 and Schoeneberger et al., 2012

Summit	The top or highest level of an upland feature such as a hill or mountain. Usually, the summit is relatively level.
Shoulder	Forms the uppermost inclined surface at the top of a hill slope. It is the transition zone from the summit to the backslope of an upland. The surface is dominantly convex in profile and erosional in origin.
Backslope	The steepest inclined surface of the hill slope. Backslopes in profile are commonly steep and linear, or steep and convex-concave. Backslopes are erosional forms produced mainly by mass wasting (direct gravitational action) and running water action.
Footslope	The inner, gently inclined surface at the base of a hill slope. The surface is dominantly concave in profile. It is a transition zone between the backslope and toeslope where colluvium and alluvium accumulate.
Toeslope	The outermost, gently inclined surface at the base of a hill slope. Toeslopes are constructional surfaces forming the outermost point of a hill slope where alluvium tends to accumulate.
Stream terrace	A natural level strip of land in a stream valley, parallel to the stream channel, originally formed near the level of the stream, and representing the dissected remnants of an abandoned flood plain or stream bed.
Flood plain	The nearly level fluvial (river) plain bordering a stream and subjected to periodic inundation and sediment accumulation under flood stage conditions. It is a constructional landform built of sediment deposited during overflow and lateral migration of the stream.

Parent Material

When rocks are exposed to atmospheric conditions, they begin to adjust to their new environment. This adjustment (known as weathering) involves processes which cause physical disintegration and chemical decomposition of the rocks. The weathering of bedrock produces unconsolidated debris serving as the parent material for soils. The parent materials undergo continued alteration and evolve into a soil reflecting the integrated effects of climate, biotic factors (plants, animals, and microorganisms), topography, and time.

Some common parent materials of the Laramie area are alluvium, colluvium, and residuum.

Alluvium	Unconsolidated material transported and deposited by flowing water.
Colluvium	Unconsolidated material deposited on and at the base of steep slopes by direct gravitational action.
Residuum	Unconsolidated weathered mineral matter accumulating by disintegration and decomposition of bedrock in place.

This page titled 9.3: Relief is shared under a CC BY 4.0 license and was authored, remixed, and/or curated by Anna R. Schwyter & Karen L. Vaughan (UW Open Education Resources (OER)) via source content that was edited to the style and standards of the LibreTexts platform.

9.4: Time

Once the solid rock materials were weathered or the alluvial and colluvial materials and aeolian dunes were deposited, plants began to grow. Nitrogen was added to soil from rainfall and the nitrogen-fixing activity of lichens, algae and legumes. Soil organic matter began to accumulate, and the soils developed a distinct dark-colored A horizon. Rain water began to dissolve and leach the calcium and magnesium carbonates. Some soils were so high in lime the leaching has not depleted the supply and these soils remain calcareous. Generally, the lime inhibits further soil profile development by reducing downward leaching of clay particles.

On the soils formed from dunes and non-calcareous sandstone and shale materials, the leaching process has removed some of the exchangeable basic cations (Ca^{2+}, Mg^{2+}, K^{+}, Na^{+}) resulting in a slightly acidic soil (pH 6 to 7). On the more permeable materials, the rain water has had sufficient time to translocate silicate clay minerals from the A into the B horizon. The clay accumulation filled the pore spaces and decreased the water permeability of the B horizon. This zone of illuvial clay accumulation is defined as an **argillic** horizon.

In poorly drained soils, little leaching occurs. These soils have suffered from a lack of oxygen resulting in reduction of iron. When this process has occurred periodically, the soil exhibits mottles, while flooded soils exhibit olive and gray colors indicative of gleying.

Because extensive erosional processes have occurred, the youngest soils may overlie the oldest geologic formations (Table 1). Young soils have developed on the stabilized sand dunes, on the flood plains, and on the steep mountain uplands. Some of the oldest soils have developed on alluvial terraces and alluvial fans of the Paso Robles Formation in California.

Table 1. Soil profile development as a function of time (chronosequence).

	Parent Material	Young Soil	Mature Soil	Old Soil
Horizon development	None	Slight	Well developed	Extensive
Typical profile	C R	A C R	O A Bt C R	O A E Bs C R
Time (yrs.)	0	10 to 1,000	1,000 to 10,000	10,000 to 100,000
Transformations	None	Humus accumulates Carbonates leach Eluviation dominates	Maximum humus Carbonates leached Clays leach Eluviation Maximum illuviation Acidic surface	Humus decreases Carbonates gone Clays leached Maximum eluviation Extensive illuviation Very acidic
Crop productivity	Low to moderate	Good	Maximum	Low

This page titled 9.4: Time is shared under a CC BY 4.0 license and was authored, remixed, and/or curated by Anna R. Schwyter & Karen L. Vaughan (UW Open Education Resources (OER)) via source content that was edited to the style and standards of the LibreTexts platform.

9.5: Soil Classification

Soils in the United States are classified according to the USDA Soil Taxonomy. Soil Taxonomy includes the system of soil classification published by the Soil Survey staff of the U.S. Department of Agriculture's Natural Resource Conservation Service (NRCS), formerly the Soil Conservation Service (SCS). This system provides a comprehensive natural classification of soils based upon measurable and observable soil morphological properties. The current Soil Taxonomy is the result of many years of observations on many different soils. Probably the greatest utility of the taxonomy is for soil management and land use planning. The nomenclature used is designed to fit into any modern language. Terms were coined mainly from Greek and Latin roots, and are used as mnemonic devices for remembering the names. Many soil properties can be described by the use of the formative elements. This system of classification is hierarchical with 12 Orders subdivided into 47 Suborders, 225 Great Groups, 970 Subgroups, more than 5,000 Families and more than 15,000 Series.

The Orders (the highest level of the classification) are distinguished on the basis of properties associated with soil-forming processes on the grand scale. One soil Order is based on the absence of any distinctive characteristics. The soils in these other 11 Orders have some diagnostic features known as diagnostic surface horizons and diagnostic subsurface horizons.

The diagnostic surface horizons are called **epipedons**, from the Greek words epi (over), and pedon (soil). The epipedon includes the upper part of the soil darkened by organic matter, the upper eluvial horizons, or both. Six epipedons are recognized, but only two (Mollic and Ochric) are common near Laramie, WY.

Mollic	A horizon—thick (>7 inches thick), dark (Munsell value darker than 3, moist chroma) surface horizon with a high percent (> 50 %) basic cation saturation, high in calcium, good structure, and not both hard and massive when dry. The horizon contains at least 1 % organic matter.
Ochric	A horizon too light, too low in organic matter, or too thin to be mollic; or both hard and massive when dry.

The diagnostic subsurface horizons are called endopedons and characterize different soils in the system. Several subsurface horizons are described in the U. S. Soil Taxonomy. Two of these (Argillic and Cambic) are common in the Snowy Range Mountains area. Not all soils have a diagnostic subsurface horizon.

Argillic	This is a Bt horizon of illuviation (accumulation) of clay. If the soil is not eroded, this horizon is in the position of the B horizon and it has more clay than the overlying A or E horizon. The Argillic horizon is generally equivalent to the Bt horizon. Field clues for identifying argillic horizons include the following factors: Higher in clay than the horizon above and generally higher than horizon below; horizon has soil structure, often being blocky or prismatic, clay films visible to the naked eye or with hand lens. Clay films are smooth, shiny clay coatings on the surface of the soil peds or aggregates.
Cambic	This is an altered or changed horizon in the position of a B horizon (an A horizon above and a C horizon below). This horizon has been changed by internal physical movement or by chemical reactions to such an extent it no longer retains the original nature of the rocks or sediments in the C horizon. Some chemical changes have occurred, but some easily weathered minerals are usually still present. Usually, some leaching has occurred in the Cambic horizon and color changes have resulted, but no evidence exists of any clay movement or illuviation (i.e. clay films). The cambic horizon is generally equivalent to a Bw horizon.

This page titled 9.5: Soil Classification is shared under a CC BY 4.0 license and was authored, remixed, and/or curated by Anna R. Schwyter & Karen L. Vaughan (UW Open Education Resources (OER)) via source content that was edited to the style and standards of the LibreTexts platform.

9.6: Soil Orders

Twelve orders exist in Soil Taxonomy, but three orders (Entisols, Inceptisols, and Aridisols) are common in the Laramie area.

Entisols	Young or very weakly developed soils with no diagnostic horizons. They may be formed in fresh alluvium of floodplains, in fresh sand dune deposits, or on steep, eroded hill slopes where diagnostic horizons either cannot form or have not had time to form.
Inceptisols	Relatively young soils with weakly developed horizons and little accumulation of clays and organic matter. They have an ochric or umbric horizon and cambic subsurface horizon.
Aridisols	Soils with an aridic soil moisture regime and some B horizon development or a salic horizon and very little organic matter.

This page titled 9.6: Soil Orders is shared under a CC BY 4.0 license and was authored, remixed, and/or curated by Anna R. Schwyter & Karen L. Vaughan (UW Open Education Resources (OER)) via source content that was edited to the style and standards of the LibreTexts platform.

9.7: Slope and Runoff

The steepness of slope is determined in percent (%) calculated as [(rise/run) x 100] using an **Abney level** or **clinometer**. The Abney level or clinometer is held at eye level and parallel to the slope. The level is adjusted allowing the % slope to be read directly. The absolute percent slope is the same whether sighting up slope or down slope.

The amount of soil erosion is directly related to the amount of **surface water runoff**, which depends on the water infiltration rate and the % slope. The steeper the slope and the less rapid the water infiltration rate, the more rapid the water runoff rate for a given soil. Soils having granular structure and high porosity have slower water runoff rates than do soils with massive structure and low porosity. This occurs because more water infiltrates into granular soils with less total water being available for over the surface water runoff when compared to massive soils. Other factors including vegetative cover, the type of vegetation, and the soil moisture content influence the surface water runoff rate. The greater the extent of plant vegetation covering the soil, the less soil erosion because the plant tissue intercepts the falling rain drops and greatly dissipates the energy of the falling water mass from directly hitting the soil. If a soil is moister, it requires less rainfall to reach the point where the soil becomes saturated (all pores filled) and water runoff occurs. Generally, as surface water runoff increases, soil erosion increases. The following table can be used to estimate the surface runoff rate using soil texture and the percentage of slope.

Table 2. Slopes, texture of surface horizons, and surface water runoff rates.

Slope (%)	Textural class	Water runoff rate
0-1	All textural classes	Very slow
1-2	Sands and loamy sands	Very slow
1-2	All textures except sands and loamy sands	Slow
2-6	Sands and loamy sands	Slow
2-6	All textures except sands and loamy sands	Medium
6-12	Sands and loamy sands	Medium
6-12	Sandy loams, sandy clay loams, loams, clay loams, silt loams, silty clay loams	Rapid
6-12	Silty clay, clay, sandy clay	Very rapid
12-18	Sands and loamy sands	Rapid
12-18	All textures except sands and loamy sands	Very rapid
>18	All textures	Very rapid

This page titled 9.7: Slope and Runoff is shared under a CC BY 4.0 license and was authored, remixed, and/or curated by Anna R. Schwyter & Karen L. Vaughan (UW Open Education Resources (OER)) via source content that was edited to the style and standards of the LibreTexts platform.

9.8: Soil Permeability

Soil permeability is the quality of a soil enabling it to transmit air or water through the soil pores. Texture, structure, cracking, and the amount of organic matter influence the permeability. The permeability of the least permeable horizon should be estimated because this becomes the most limiting horizon for water and air movement and root penetration. The soil permeability classes are slow, moderate, and rapid.

Slow permeability	< 0.6 inches of water move through the soil per hour. Slow permeability includes textures of silty clay, clay and sandy clay and soils with massive subsoils.
Moderate permeability	0.6–6.0 inches of water move through the soil per hour. Moderate permeability includes textures of silt loam, loam, sandy clay loam, silty clay loam and sandy loam.
Rapid permeability	6–20 inches of water move through the soil per hour. Rapid permeability includes textures of loamy sand and sand and soils with greater than 15 % gravel.

This page titled 9.8: Soil Permeability is shared under a CC BY 4.0 license and was authored, remixed, and/or curated by Anna R. Schwyter & Karen L. Vaughan (UW Open Education Resources (OER)) via source content that was edited to the style and standards of the LibreTexts platform.

9.9: Laramie's Local Soils

An example of one of the most common local soils is the Wycolo series (Source: Albany County (Albany County Area), Wyoming; 1991. Soil Survey Report).

Wycolo Series

The Wycolo series consists of moderately deep, well drained soils that formed in materials derived from interbedded limestone, redbed sandstone, and shale. Wycolo soils are on uplands, structural benches, and strath terraces. Slopes range from 2 to 20 percent. The soils formed in materials weathered from interbedded limestone, redbed sandstone, and shales. Elevations are 6,000 to 7,800 feet. The mean annual precipitation is 10 to 14 inches of which at least half occurs in the spring months. The mean annual temperature is 40 to 45 degrees F., and the frost-free season is 85 to 110 days.

Well drained; runoff is medium; moderate permeability. These soils are used mainly as rangeland. Native vegetation is western wheatgrass, needle and thread, and big sagebrush.

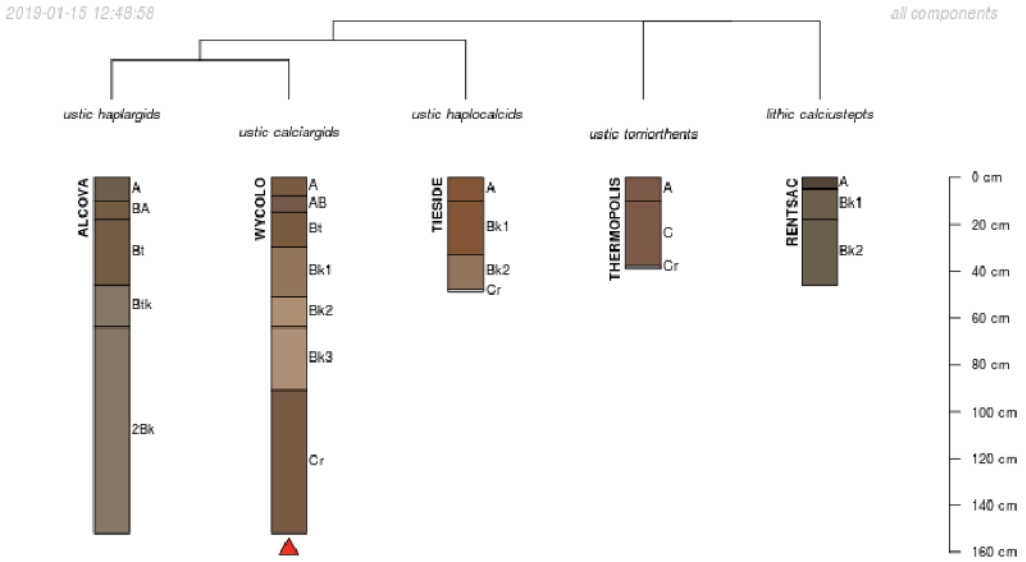

Read through and complete the following activity and questions. All questions should be answered and completed labs are due at the end of the laboratory period. No late work will be accepted.

This page titled 9.9: Laramie's Local Soils is shared under a CC BY 4.0 license and was authored, remixed, and/or curated by Anna R. Schwyter & Karen L. Vaughan (UW Open Education Resources (OER)) via source content that was edited to the style and standards of the LibreTexts platform.

9.10: Activity 1 - Soil Formation

1. Identify the parent material/s for each local soil. Use the appropriate name (e.g. residuum, colluvium, etc. and the rock type if the parent material is residuum; e.g. residuum – shale).

   https://soilseries.sc.egov.usda.gov/osdname.aspx

Soil Series	Parent Material	Rock type	Soil Series	Parent Material	Rock type
Alcova			**Canwall**		
Tieside			**Redrob**		
Pilotpeak			**Poposhia**		

1. Define argillic horizon.
2. Define Aridisol.
3. Define mollic epipedon.
4. Define cambic horizon.
5. Compare the rate of nitrate fertilizer leaching in an arid climate versus a humid climate.
6. Compare the rate of soil profile development in the Brazilian rainforest versus on the prairie east of Laramie.
7. How would soil temperature, evaporation, and soil formation differ for soils forming on north versus south facing slopes (assume the same parent materials and landscape positions)?
   - North aspect:
   - South aspect:
8. What differences can be expected in two soils formed from the same parent material, but where one soil occurs on a 1 % slope (summit) and the other soil occurs on a 35 % (backslope) slope with all other soil-forming factors being the same?
   - 1 % slope:
   - 35 % slope:
9. How does soil color change with depth for the soil profile? Explain.
10. How does soil texture change with depth for the soil profile? Explain.

Soil order	
Soil series	
Land use	
landscape position	
Slope %	
Water runoff class	
Water permeability class	

Name: _____ Date: _____

Site Name: _____ Group name: _____

	Horizon	Depth	Moist Color			Texture			Structure	Redox Features		Carbonates
		cm	Hue	Value	Chroma	rock frag.	RF mod.	Class		Conc.	Deplet.	Efferv.
						%				Y/N	Y/N	Y/N
1												
2												
3												
4												
5												
6												

Climate	SMR: STR:
Organisms	
Relief	
Parent **M**aterial	
Time	
other comments	

REMINDERS/Assignments for next week's lab:

1. Study for pre-lab Quiz on material from Lab #10: Soil Ecology
2. Watch one of the videos listed under Lab 10 "Additional Resources"
   - Write a paragraph describing:
     1. One thing you learned from the video you chose
     2. An interesting fact about what you learned iii. How it relates to another field of study

This page titled 9.10: Activity 1 - Soil Formation is shared under a CC BY 4.0 license and was authored, remixed, and/or curated by Anna R. Schwyter & Karen L. Vaughan (UW Open Education Resources (OER)) via source content that was edited to the style and standards of the LibreTexts platform.

CHAPTER OVERVIEW

10: Soil Ecology

Learning Objectives

- Measure microbial transformations of carbon and nitrogen.
- Create and observe Winogradsky columns.
- Know the products of organic matter decomposition.
- Understand how the carbon to nitrogen ratio (C/N) of organic materials applied to soil influences the nitrogen availability for crops.
- Learn the carbon and nitrogen cycles.
- Explore soil organisms

GOAL: To understand the role of soil microorganisms in cycling of organic matter and nutrients.

10.1: Microbial Activity and the Carbon Cycle
10.2: Humus
10.3: Soil Microorganisms
10.4: Mineralization
10.5: Carbon/Nitrogen Ratio
10.6: Nitrogen Cycle
10.7: Major components of the Nitrogen Cycle
10.8: Activity 1 - Soil Incubation
10.9: Activity 2 - Carbon Dioxide
10.10: Activity 3 - Soil Nitrate-Nitrogen Analysis
10.11: Activity 4 - Decomposition Questions
10.12: Activity 5 - Winogradsky Columns

Additional resources:

- Soil Ecology – what lies beneath https://www.nature.com/news/2008/081...l/455724a.html
- The Carbon Cycle – What goes around comes around https://www.visionlearning.com/en/li...arbon-Cycle/95
- Carbon cycle video by World Meteorological Organization: https://www.youtube.com/watch?v=E8Y6L5TI_94 (video length: 1:46)

This page titled 10: Soil Ecology is shared under a CC BY 4.0 license and was authored, remixed, and/or curated by Anna R. Schwyter & Karen L. Vaughan (UW Open Education Resources (OER)) via source content that was edited to the style and standards of the LibreTexts platform.

10.1: Microbial Activity and the Carbon Cycle

The solid portion of soil is composed of minerals and organic matter. The organic matter includes plant and animal residues at various stages of decomposition, cells and tissues of soil organisms, and substances synthesized by the soil biota. Each of these contains many types of compounds including proteins, sugars, polysaccharides such as cellulose, hemicellulose, and starch, and complex fats, waxes, and lignins. All the lifeessential elements are contained in the collection of organic compounds found in soils.

The total amount of organic matter in soil and the nutrients it contains vary with the climate, nature of the parent material, soil pH, and the kind and amount of vegetation produced on or applied to the soil.

The process of soil organic matter decomposition and humus formation may be represented as a partial oxidation process as follows:

organic substances + O_2 + microorganisms + suitable environment ------> CO_2 + H_2O + Energy (both as heat and for microbial growth) + humus + new microbial cells + inorganic plant nutrients (Ca^{2+}, Cl^-, Co^{2+}, Cu^{2+}, Fe^{2+}, H_3BO_3, $H_2PO_4^-$, K^+, Mg^{2+}, Mn^{2+}, MoO_4^{2-}, NH_4^+, Ni^{2+}, S^{2-}, and Zn^{2+})

Under natural soil conditions, organic residues undergo an initial rapid decomposition, which liberates large amounts of carbon dioxide, water, energy, and releases small quantities of inorganic nitrogen, phosphorus, sulfur and other plant nutrients. Probably the most important function soil microorganisms serve is to recycle organic carbon to carbon dioxide, thereby maintaining photosynthesis on the earth.

The microbial oxidation process slowly decomposes plant and animal residues. Nutrients contained in the plant and animal tissue are transformed from unavailable organic forms to plant-available inorganic forms during the microbial oxidation. Hence, organic matter acts similar to a very slow-release fertilizer and buffers the soil-plant environment against drastic fluctuations in available plant nutrients. The complete cycling of carbon through plants, animals, organic residue, humus, and CO_2 eventually occurs.

A soil containing one percent organic matter contains up to 45 million kilocalories of potential energy per acre-furrow-slice. This energy is equivalent in heating value to about 6 tons of coal, or 31 barrels of crude oil or 168,000 cubic feet of natural gas. Soil microorganisms use only a small amount of the energy from the decomposition of organic residues for building new cells. The production of a single pound of soil organic matter from plant residues that have been amended with fertilizer nitrogen requires the total destruction of perhaps 10 to 20 pounds of plant residues to provide the energy for the process. Furthermore, whenever fresh residues are applied to soil, the decomposition of "humified" organic materials already present in the soil is accelerated.

The principal reasons for adding organic residues to soils are to modify the tilth of the soil, making seed bed preparation easier, to add plant nutrients, and to dispose of unusable or unwanted organic waste. Other benefits of adding organic matter to soils include improved soil structure, increased cation exchange capacity, increased water holding capacity, increased aeration, and a reduction in soil erosion.

This page titled 10.1: Microbial Activity and the Carbon Cycle is shared under a CC BY 4.0 license and was authored, remixed, and/or curated by Anna R. Schwyter & Karen L. Vaughan (UW Open Education Resources (OER)) via source content that was edited to the style and standards of the LibreTexts platform.

10.2: Humus

Humus is the stable, amorphous, heterogeneous fraction of the soil organic matter remaining after the major portion of added plant and animal residues have decomposed. It is dark brown to black. It is bound to the surfaces of clays and hydrous oxides, which renders it resistant to microbial attack. The original source of the organic materials is not easily determined.

Humus has a low bulk density (0.05 to 0.25 grams per cubic centimeter), is very finely divided (colloidal), and has a high porosity and water holding capacity. It has a very high cation exchange capacity (greater than 200 milliequivalents per 100 grams of pure humus or 200 centimoles(+) per kilogram of pure humus) which allows it to retain cations such as Ca^{2+}, H^{+}, K^{+}, Mg^{2+}, Na^{+}, and NH_4^{+} ions). Humus has a variable composition but approximates 50% carbon, 35% oxygen, 8 % hydrogen, 5% nitrogen, and 2% sulfur plus traces of all other essential elements for microbial life.

The humus content of arable soils averages between 2-3% and has a range of <1 to over 12%. Humus significantly influences physical and chemical properties of soils. It commonly is responsible for 20 to 30 % or more of the cation exchange capacity of soils. It buffers the soil against drastic chemical changes in pH in the root environment. Humus provides stability to soil peds by acting as a binding agent promoting soil aggregation.

Two factors restrict the ability to increase the humus content of a soil. First, the amount of organic material that must be applied and incorporated into the soil will be very large. The amount of organic material necessary to maintain the normal humus level in soil ranges from 1000 to 5000 kg/ha per year (1000 to 5000 pounds per acre-furrow-slice per year). Second, the addition of organic material to the soil will not permanently increase the soil's humus content. The natural physical and biological changes in the soil will hasten the decomposition of the organic residues resulting after a few years in only a small quantity of the added material remaining as humus. Cultivated soils lose humus by biological decomposition at a rate of 1 to 2% per year. Crop rotations including grasses and legumes in conjunction with conservation tillage and crop residue management can be used to sustain the humus level and productivity of agricultural soils.

This page titled 10.2: Humus is shared under a CC BY 4.0 license and was authored, remixed, and/or curated by Anna R. Schwyter & Karen L. Vaughan (UW Open Education Resources (OER)) via source content that was edited to the style and standards of the LibreTexts platform.

10.3: Soil Microorganisms

Soil organisms usually comprise much less than 0.5 % of the dry soil mass. Practically nothing can be done to permanently alter the microbial population of a soil. Normally, the soil contains a vast array and abundance of organisms. Consequently, most direct additions of organisms (**inoculation**) to this community will be ineffective. Usually, microbial populations will be altered more by changing the crop growing in the soil than by adding other microorganisms. However, in soils that have been steam sterilized or fumigated to control plant pathogens, the microbial numbers have been reduced greatly (but not eliminated). Adding fresh soil to a steam-sterilized soil will reintroduce many microbes but may add undesirable plant pathogenic microbes with the fresh soil. The average biomass distribution in an acre-furrow-slice of soil is approximately as presented in Table 1.

Table 1. Distribution of living organisms and organic matter in an acre-furrow-slice (about 2,000,000 lbs. soil) of a highly productive soil.

Soil Organisms	**Estimated biomass**	Number of organisms	
	lbs./AFS or kg/ha†	Number/AFS	Number/g
Earthworms	200 to 500	1.5×10^{5}	1.6×10^{-4}
Myriapods	5 to 40	2.2×10^{6}	2.4×10^{-3}
Insects	100 to 200	5.05×10^{3}	2.3×10^{-6}
Rodents	50 to 100	1.3×10^{2}	1.4×10^{-7}
Nematodes	1 to 2	9.1×10^{7}	1.0×10^{-1}
Plant roots + root hairs	2,500 to 4,000	1.13×10^{13}	1.35×10^{4}
Bacteria	3,000 to 4,500	2.4×10^{18}	2.6×10^{9}
Actinomycetes	1,000 to 2,000	1.3×10^{17}	1.4×10^{8}
Fungi	2,500 to 4,500	3.3×10^{15}	3.7×10^{6}
Protozoa	10 to 75	1.2×10^{13}	1.3×10^{4}
Algae	5 to 10	2.5×10^{14}	2.8×10^{5}
Dead organisms + humus	40,000 to 60,000	---	---

Source: Brady, N.C. and R.R. Weil. 2002. The nature and properties of soils. 13th ed. Prentice Hall, Upper Saddle River, NJ. †AFS = acre-furrow-slice = 2,000,000 lbs. of dry soil which is assumed to contain about 2.5 % humus. 1 hectare-15 cm = 2,000,000 kg of dry soil which is assumed to contain about 2.5 % humus.

A number of conditions affect microbial populations in soils. The optimum temperature range for decay organisms is between 70-100 °F (about 20-40 °C). Soil temperatures outside this range will retard the activity of most soil organisms. Excessive water in soil reduces the numbers and kinds of living organisms due to poor aeration. However, at low moisture levels soil organisms thrive better than do higher plants. Numbers of fungi, bacteria and actinomycetes vary with soil pH. If pH of the soil is <6.0, the fungi become the dominant soil microorganisms. The supply of nutrients, organic material for energy, and free oxygen gas affect microbial numbers. Fortunately, optimum soil conditions for most plants and for most soil microorganisms are similar.

This page titled 10.3: Soil Microorganisms is shared under a CC BY 4.0 license and was authored, remixed, and/or curated by Anna R. Schwyter & Karen L. Vaughan (UW Open Education Resources (OER)) via source content that was edited to the style and standards of the LibreTexts platform.

10.4: Mineralization

Mineralization is the process of converting elements from an organic form to an inorganic form by microbial decomposition. After the addition of organic materials to soil, the rate of release of carbon dioxide reaches a peak in a few days and then tapers off with time. The peak is associated with an explosive growth in the microbial population, which consumes plant nutrient ions that are needed for building new cells. The decline in carbon dioxide production occurs because the microbes have consumed most of the readily decomposable high energy organic materials. The rate of carbon dioxide production and microbial population is dramatically reduced simultaneously.

As the microbial activity declines, the dead cells are destroyed, releasing nutrients in plant available inorganic form. Nitrogen is released as ammonium (NH_4^+). Sulfur is released in a reduced form as sulfide (S^{2+}). Most other nutrients are released in the ionic form (e.g. $H_2PO_4^-$). The mineralization of large quantities of nitrate and sulfate signal the completion of the major microbial degradation process

This page titled 10.4: Mineralization is shared under a CC BY 4.0 license and was authored, remixed, and/or curated by Anna R. Schwyter & Karen L. Vaughan (UW Open Education Resources (OER)) via source content that was edited to the style and standards of the LibreTexts platform.

10.5: Carbon/Nitrogen Ratio

The proportion of carbon to nitrogen in the organic matter is an important factor in controlling microbial activity. Organic material having a high carbon to nitrogen ratio (C/N), such as wheat straw at about 80/1, will decay relatively slowly because the material contains insufficient nitrogen to satisfy the growth requirements of the decay producing microorganisms. Soil microorganisms often retain the available nitrogen for prolonged periods. This nitrogen immobilization by microbes can create nitrogen deficiencies in the soil and lead to reduced plant growth. Legume residues, such as clovers and alfalfa, have low C/N ratios (< 30/1) and decay very rapidly in the soil. They release large amounts of CO_2 and some nutrients for plant growth. Materials from young plants, having low C/N ratios, decompose more rapidly than do materials from old plants, having higher C/N ratios. A list of common organic materials and their C/N ratios is provided in Table 2.

Table 2. The C/N ratio for some common organic materials.

Organic substance	Carbon	Nitrogen	C/N ratio
Microorganisms	50	6.2	8/1
Humus	50	4.5	11/1
Alfalfa	43	2.5	18/1
Clover hay	40	2.0	20/1
Barnyard manures	35	1.4	25/1
Sewage sludge	48	1.7	28/1
Rye grass	40	1.3	30/1
Peat moss	48	0.8	60/1
Corn stalks	44	0.6	73/1
Barley straw	45	0.1	450/1
Fir bark	54	0.1	540/1
Redwood sawdust	51	0.05	1020/1

Microbial decay of organic matter releases copious amounts of carbon dioxide. In this way carbon is cycled from the soil to the air, completing the carbon cycle that began with photosynthesis. More microbial activity is synonymous with a greater production of carbon dioxide by soil microbes.

Composting of organic material is one way to manage the overall decay process. This allows time for the microbes to decompose most of the organic residues.

This page titled 10.5: Carbon/Nitrogen Ratio is shared under a CC BY 4.0 license and was authored, remixed, and/or curated by Anna R. Schwyter & Karen L. Vaughan (UW Open Education Resources (OER)) via source content that was edited to the style and standards of the LibreTexts platform.

10.6: Nitrogen Cycle

The nitrogen in humus and other organic materials released by microbes during the decay process can undergo several transformations in the soil. The ammonium (NH_4^+) is oxidized by *Nitrosomonas* to nitrite (NO_2^-) and is further oxidized by *Nitrobacter* to nitrate (NO_3^-). These two ions can be immobilized by plants and soil microorganisms or be changed in the nitrogen cycle.

This page titled 10.6: Nitrogen Cycle is shared under a CC BY 4.0 license and was authored, remixed, and/or curated by Anna R. Schwyter & Karen L. Vaughan (UW Open Education Resources (OER)) via source content that was edited to the style and standards of the LibreTexts platform.

10.7: Major components of the Nitrogen Cycle

Nitrogen Fixation	Nitrogen fixation is the microbial conversion of nitrogen gas (N_2) to ammonium (NH_4^+). Various bacteria in plant roots perform this process. Recently, soil microbiologists have reclassified all of the microorganisms that fix nitrogen. The following list provides the new classification of these microbes and the plants that they infect.
Mineralization	Mineralization is the conversion of organic nitrogen to inorganic ammonium (NH_4^+).
Nitrification	Nitrification is the oxidation of ammonium ions (NH_4^+) to nitrate ions (NO_3^-).
Immobilization	Immobilization is the assimilation of ammonium (NH_4^+) and nitrate (NO_3^-) into tissue
Denitrification	Denitrification is the reduction of nitrate (NO_3^-) to nitrogen gases (N_2, N_2O, NO, and/or NO_2) under anaerobic soil conditions (in very wet soil).
Volatilization	Volatilization is the chemical conversion of ammonium (NH_4^+) ions to ammonia gas (NH_3) in high pH soils and is accelerated by drying of the soil.

Read through and complete the following activity and questions. All questions should be answered and completed labs are due at the end of the laboratory period. No late work will be accepted.

This page titled 10.7: Major components of the Nitrogen Cycle is shared under a CC BY 4.0 license and was authored, remixed, and/or curated by Anna R. Schwyter & Karen L. Vaughan (UW Open Education Resources (OER)) via source content that was edited to the style and standards of the LibreTexts platform.

10.8: Activity 1 - Soil Incubation

Name: _____

Section: _____

Student ID#:_____

Microbial Observations

1. Carefully retrieve the 3 plastic bottles from the incubation shelf keeping them vertical during the transfer from the incubation area to your desktop
2. Open each bottle one at a time. Examine the contents of the bottles by performing the procedures indicated below.
    1. Move your hand across the top of the bottle bringing the air towards your nose.
    2. Smell the air and record the odor of what you smell.
    3. Examine the soil surface of each bottle for fungi using first your eyes and then the microscope. Fungi produce fungal mycelia as tissue that has the appearance of fine cotton threads or spider webs.
3. Rate the appearance of fungal mycelium in the **control, alfalfa, and sawdust** bottles using the terms none, slight, abundant, or overgrown.

	Odor detected	Appearance of fungal mycelium
Control		
Alfalfa		
Sawdust		

Carbon Dioxide

During the microbial incubation, the microbes decomposed the organic amendments and the humus in the soil, releasing carbon dioxide into the atmosphere of the incubation bottle.

Date experiment was initiated = _____ Date analyzed = _____

Number of days of incubation = _____

This page titled 10.8: Activity 1 - Soil Incubation is shared under a CC BY 4.0 license and was authored, remixed, and/or curated by Anna R. Schwyter & Karen L. Vaughan (UW Open Education Resources (OER)) via source content that was edited to the style and standards of the LibreTexts platform.

10.9: Activity 2 - Carbon Dioxide

Name: _____

Section: _____

Student ID#:_____

1. Draw a simple version of the carbon cycle. (Refer to your textbook for help.) Include the atmosphere and plants.
2. What process of the carbon cycle is responsible for releasing CO_2 into the soil atmosphere?
3. How might this release of CO_2 into the soil atmosphere affect the soil pH? Write a chemical reaction for this process.
4. Rank the soils in order of probable amount of CO_2 released, from the greatest amount released to the least amount released (begin with the soil with largest quantity of CO_2 released. Briefly explain your answer.

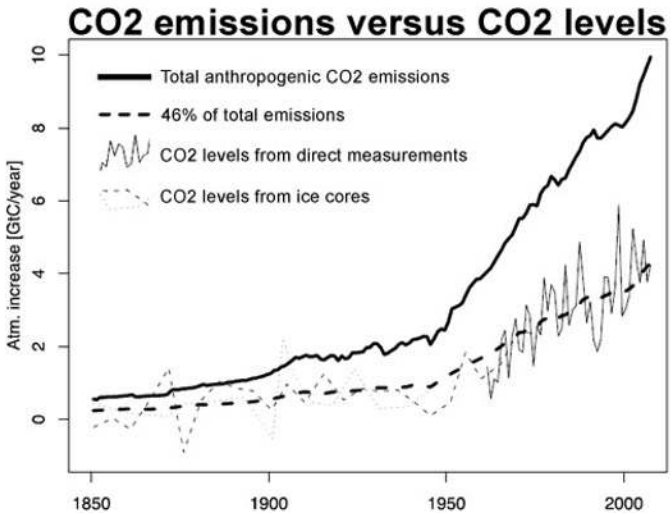

Figure 1: *Observed increase atmospheric CO_2 derived from direct measurements, taking the average of Mauna Loa (Hawaii) and the South Pole (thin solid line) and two ice cores: Law Dome (dashed thin line) and Siple (thin dotted line). This is compared to total anthropogenic emissions (thick solid line) and 46% of total emissions (thick dashed line). (Knorr 2009)*

5. Increasing temperatures on earth is attributed to an increase in carbon dioxide, which traps heat via the greenhouse effect. The increased atmospheric carbon dioxide is due to the burning of fossil fuels. Explain why carbon dioxide levels in the world's atmosphere has lagged behind emissions. Consider possible carbon sinks that may be keeping carbon in terrestrial and marine environments.

This page titled 10.9: Activity 2 - Carbon Dioxide is shared under a CC BY 4.0 license and was authored, remixed, and/or curated by Anna R. Schwyter & Karen L. Vaughan (UW Open Education Resources (OER)) via source content that was edited to the style and standards of the LibreTexts platform.

10.10: Activity 3 - Soil Nitrate-Nitrogen Analysis

Name: _____

Section: _____

Student ID#:_____

Adapted from: T.K. Hartz. 2010. Using the Pre-Sidedressing Soil Nitrate 'Quick Test' to Guide N Fertilizer Management. UC Vegetable Research and Information Center.

Safety Considerations: Read hazard information below on today's experiment. Wear appropriate eye protection. Avoid contact with skin for all corrosive and irritating reagents. If contacted, flush with copious amounts of water and inform your instructor immediately.

Hazard information: Calcium chloride (0.01 M $CaCl_2$) may cause eye, skin, and respiratory tract irritation.

Procedure

1. After viewing each of the three treatment containers with the binocular microscope, carefully add 50 ml of the 0.01 *Molar* calcium chloride extracting solution to each of the containers.
2. Using a glass stirring rod, stir mixture for 30 seconds. Rinse stirring rod and return to proper location.
3. Allow containers to sit undisturbed for 15 minutes while soil particles settle.
4. After the settling period, obtain one nitrate strip for each container and carefully tilt the container to about a 45-degree angle to allow enough depth of solution for dipping of the test strip. Dip the test strip with tab facing down to avoid floating organic matter. Lightly shake off any excess solution and read the nitrate color from the test strip against the color chart at one minute after dipping. The color pad at the end of the test strip is the one to read for nitratenitrogen.
5. **Cleanup**: Place the nitrate test strip into a trash can and thoroughly rinse the plastic container with tap water to remove all soil and extraction solution, dumping rinse material into bucket in sink. Place plastic container in proper storage container.

Nitrate Observations

	Color of the test strip	Amount of nitrate produced (ppm)
Control		
Alfalfa		
Sawdust		

Nitrate Questions

1. Rank the treatments (control, alfalfa, sawdust) in terms of the amount of nitrate produced in each treatment, from greatest to least amount of nitrate produced.

Immobilization of nitrogen occurs when the carbon to nitrogen ratio (C:N) is high (≥30:1) and an insufficient level of ammonium and nitrate exist in the soil to meet the needs of the microorganisms that are decomposing the organic matter. Usually, immobilization occurs when the nitrate level is nearly zero. Immobilization occurs during the initial part of the degradation of most organic materials in the soil. After a sufficient period of time, the microbes will run out of energy after they have decomposed most of the organic material and release large amounts of carbon dioxide. Once the microbes have run low on energy, they begin to release extra ammonium into the soil by the process of mineralization. The ammonium produced in the soil is rapidly converted to nitrate by the nitrifying bacteria. Consequently, after mineralization, the nitrate level in the soil amended with an organic material will be higher than was the nitrate level of the original soil.

2. Based on the discussion above, briefly explain the ranking (#1) (the amount of nitrate produced in each treatment).

3. Do your results for the amount of nitrate in each treatment make sense in terms of the C/N ratios of the various treatments?

4. What would be the effect on plants if a finely ground organic matter having high C/N (85/1 straw) were added to the soil?

5. What 3 practical steps can be taken to reduce nitrogen immobilization by microorganisms and the resulting nitrogen deficiency in the plants when applying high C/N organic materials to soils for the next crop?

This page titled 10.10: Activity 3 - Soil Nitrate-Nitrogen Analysis is shared under a CC BY 4.0 license and was authored, remixed, and/or curated by Anna R. Schwyter & Karen L. Vaughan (UW Open Education Resources (OER)) via source content that was edited to the style and standards of the LibreTexts platform.

10.11: Activity 4 - Decomposition Questions

Name: _____

Section: _____

Student ID#:_____

1. Will various soils high in organic matter and humus always have a high level of microbiological activity—Yes or No? (Circle choice) Explain.
2. Explain how the C/N ratio of various organic materials influences the time required for microbiological decomposition.
3. List 5 specific benefits of adding organic residues to soils.
4. What are the 6 most important factors affecting the decomposition of crop residues and other organic waste materials added to soil? (Hint—Consult your text book for possibilities.)

This page titled 10.11: Activity 4 - Decomposition Questions is shared under a CC BY 4.0 license and was authored, remixed, and/or curated by Anna R. Schwyter & Karen L. Vaughan (UW Open Education Resources (OER)) via source content that was edited to the style and standards of the LibreTexts platform.

10.12: Activity 5 - Winogradsky Columns

Name: _____

Section: _____

Student ID#:_____

Adapted from HHMI BioInteractive activity "Winogradsky Columns: Microbial Ecology in the Classroom"

Introduction

Microorganisms play an essential role in cycling elements that make the planet habitable for all other types of organisms. The diversity of these simple life forms is evident in the myriad of ecological niches they inhabit, from hydrothermal vents to the acidic lining of your stomach.

In this activity, you will observe a sampling of the diverse microorganisms that live in your local environment. Winogradsky columns will be set up-simple devices for constructing a stratified ecosystem-that illustrate different types of microbial metabolism in a colorful way.

Samples will be set up at the beginning of the semester and you will be required to make observations four times throughout the the spring. Answers to the questions below are due in **Lab 10: Soil Ecology** so ensure that you have completed these by that lab period.

Materials

- 4 clear containers
- 1-4 disposable containers (plastic baggies) for mixing soil
- 1 trowel for digging sediment sample
- 4 small labels
- Water
- 1 bucket container large enough to hold 6-10 cups of soil
- Large measuring cup for measuring soil and mixture
- A carbon source (organic forest litter); appx 1 cup loosely packed
- 6-10 cups soil
- Sulfur source; raw egg yolk is best
- Large mixing spoon
- 1 funnel

Procedure

Four Winogradsky columns will be set up: a control column and columns that contain added carbon, added sulfur, and carbon and sulfur. Make sure to set aside a few minutes on each of the assigned observation weeks during the experimental period to make observations and take photos of your columns.

Collect the Soil Sample

1. Identify a soil source in your area-anywhere with soil and water is appropriate, such as a stream, creek, lake beach (sand) or even back yard.
2. Take 2-3 photographs of your sample site to illustrate the location where your sediment was collected.
3. Collect approximately 10 cups of sediment in the bucket. The sample should be wet. Avoid or pick out rocks, sticks and leaves; include some additional water from the sample site if possible.

Assemble the Winogradsky Columns

1. Label 4 containers: "Control," "Carbon," "Sulfur," and "Carbon and Sulfur."
2. Label 4 disposable containers corresponding to the plastic containers and add appx 1.5 cups soil to each. Do not cross-contaminate samples.
3. For "Control" column, skip to step 5
4. For the other three containers,
    1. For "Carbon" column: Add ½ cup shredded newspaper (loosely packed) to soil and mix with spoon or trowel
        - The newspaper contains cellulose, a source of carbon
    2. For the "Sulfur" column: Add the yolk of a raw egg to the soil and mix. If using hardboiled eggs, crumble the yolks.
        - Egg yolk is a source of calcium sulfate in the column
    3. For the "Carbon and Sulfur" column: Add both nutrients as described in steps a and b.
5. Mix each of the samples thoroughly. Make sure to remove any large debris such as leaves, rocks or sticks. Slowly mix in water until the mixture has a milkshake consistency.
6. Using a large spoon, slowly add appx 1 cup of the mixture to the appropriately labeled plastic column. As you add the sample, tap the column on the counter to release any trapped air in the column.
7. Add water on top of the soil until there is a 2 cm layer of water on the surface, and air at the top of the column.
8. Place the lid on each column and turn a half turn. **Do not** tighten the lid!
9. Place all 4 columns in a well-lit place (window).
10. Using a camera or phone, take a photograph of the columns to document week 0 of experiment.

Make and report observations

A. Weekly observations

You will observe your Winogradsky columns throughout the semester during labs 3, 5, 8 and 10. Spend a few minutes on assigned dates recording your visual observations and take a photograph (remember to label photos with the week the photo was taken).

Consider the following questions when recording observations:

- Has the color of the soil changed?
- Has the color of the water changed?
- What differences between the columns do you observe?
- Does the soil appear to have shifted or settled?
- Do you see any layers forming in the sediment? In the water?
- How does the thickness of the layers change from week to week?
- Are there any differences between the side facing the light and the side away from the light? Be sure to keep the same orientation relative to the light if you must move the columns.
- Sketch the columns, in color, three times over the 8-week experiment.

Date	Observations during the week of:	Control	Carbon	Sulfur	Carbon & Sulfur
	0				
	Lab 3				
	Lab 5				
	Lab 8				
	Lab 10				

Questions

1. How do your columns differ? How are the similar?
2. Did you observe changes in the control column? If so, explain why they occurred
3. Winogradsky columns form oxygen concentration gradients. Predict the distribution of oxygen throughout the column. Consider the soil, water and air
4. Winogradsky columns form sulfide concentration gradients as well. In the columns that contain egg yolk, predict how sulfide will be distributed throughout the column.
5. Purple sulfur bacteria and green sulfur bacteria are two types of bacteria that use sulfide to support photosynthesis. In general, green sulfur bacteria tolerate higher levels of sulfide than purple sulfur bacteria do. Predict where the green and purple sulfur bacteria would be in relation to each other.
6. If samples were extracted from various layers of all the columns, where would you find photosynthetic organisms such as cyanobacteria and algae? Why?
7. Explain how Winogradsky columns illustrate the diversity of microorganisms found on Earth today in terms of the diversity of niches they occupy.

This page titled 10.12: Activity 5 - Winogradsky Columns is shared under a CC BY 4.0 license and was authored, remixed, and/or curated by Anna R. Schwyter & Karen L. Vaughan (UW Open Education Resources (OER)) via source content that was edited to the style and standards of the LibreTexts platform.

CHAPTER OVERVIEW

11: Makeup Lab: Land Use

Learning Objectives

- To conduct a photographic scavenger hunt for soil science related items/concerns/concepts.

GOAL: To become familiar with soil and the related uses made of these soils in the local area.

11.1: Information and Activity

Instructions

- Form a group of no more than 4 students from the introductory soil science course or work alone.
- Identify, locate, and photograph at least 10 of the following items. You will receive 1 point for each item up to 10 points. If you are unsure about any of your photos – take a few extra to ensure you get the full 10 points.
- As a group, assemble a document that contains the photographs along with a detailed caption that answers the question posed in the table below. Your lab instructor may require a presentation, poster, or word document.
- Be sure that everyone's first and last names are on the finished assignment. Ask your lab instructor how to submit this assignment.

This page titled 11: Makeup Lab: Land Use is shared under a CC BY 4.0 license and was authored, remixed, and/or curated by Anna R. Schwyter & Karen L. Vaughan (UW Open Education Resources (OER)) via source content that was edited to the style and standards of the LibreTexts platform.

11.1: Information and Activity

Item/concern/concept to be photographed	Caption requirements
A. Evidence of good or sound land management.	What is the land use and why is it considered good management?
B. Evidence of poor land management.	What is the land use and why is it considered poor management?
C. Soil structure – from a previously exposed soil profile	What type of structure is this and where was the photo taken?
D. Evidence of proper water management	What is it and why is this smart water usage?
E. Parent material – a photo from aboveground is fine	What is this PM and how do you know this?
F. Rock	What is this rock, where did you find it, and how do you know that it is correctly identified?
G. Mineral	What is this mineral and how do you know that it is correctly identified?
H. Soil as engineering media	Where are you and why is this soil considered engineering media?
I. Soil as agricultural media	Where are you and what is being grown in this soil?
J. Evidence of biological activity in the soil	What organism is responsible for this activity and is the activity beneficial or harmful and why?
K. Soil organism	What is the organism and how did you capture it? How does this organism affect the soil?
L. Soil order – a photo of any soil order taken from aboveground – unless there is an open soil pit or exposed soil	What is the soil order and how can you be sure that it is correctly identified?
M. Something used in everyday life that is reliant on the soil	What is it and why is it reliant on the soil?

You may only photograph 2 items/concerns from each row (i.e. 2 soil orders, 2 parent materials, 2 soil structures…). You will receive an extra point (for a total of 11/10) if you take a photo of the entire group in front of one of the items!

Land Use Planning

Basic Concepts of Land Use Planning

A general map of the local soils plus detailed soil maps is essential for sound land use planning. Soil survey reports usually evaluate soils for their limitations in various land use categories. Some of these common land use categories include dwellings as homes or light industry, septic tank drainage fields, highways, railroads, airport runways, campground and picnic areas, recreational activities (golf courses, parks etc.), cultivated crop production, rangeland productivity, forest products production, and watershed management.

Some of the most commonly monitored soil properties bearing upon land use decisions include slope, susceptibility to erosion, water drainage, wetness, water overflow, pending or flooding hazard, water permeability, soil depth to hard rock, shrink and swell potential, corrosion potential, and the ability of the soil to bear highways and large buildings.

Land Use Planning Process

The land use planning process requires balancing the concerns for the physical nature of the soil (texture, structure, and water holding ability), chemical characteristics (pH, electrical conductivity, exchangeable sodium percentage, and plant nutrient fertility), and biological productivity (microbial activity, C/N ratio, crop yields) with the economic considerations (current market value of the land, tax valuation, and effectiveness of agricultural marketing) considering the legal aspects (zoning and ordinances relative to land use), the political acceptability of any future decisions regarding the use of the land, the acceptability of changes in land use (based upon social and cultural mores, customs, attitudes, and beliefs) and the practicality of developing a manageable and effective plan which can be implemented and administered in a meaningful and efficient manner.

At the heart of the planning process regarding land use are philosophical and legal conflicts regarding how we view the use and ownership of land. To what extent should the rights of the individual land owner be dominated by public good obtained by using the land in some other manner? Does the private land owner (farmer or rancher) have an unrestricted right to make a profit by selling the land (often for urban development) when society may deem this land should remain in agriculture or be preserved as a green belt area? What local, county, state, or federal laws will prevent changing the current use of a particular parcel of land? Thus, serious attention to the political consequences of any land use decision must be given through local governmental bodies (County Boards of Supervisors) or other regional authorities (Bureau of Land Management).

Land use planning is a continuous process that is continually being changed and modified as the values of individuals and communities change and as the needs and requirements of people and communities change over time. Land use planning always uses hindsight to project the needs, requirements, and potentials for future generations.

Agricultural uses

Intensive crop production requires suitable highly productive soils. Cultivation should be avoided on lands not suitable for intensive agricultural production or on highly erodible land. Future generations expect a continued supply of healthful and affordable food. This will require a sustainable farming enterprise that will insure continued soil productivity for the future.

Increasingly, people are concerned about both the future productivity of the land and about the nature of the overall quality of the soil health (microorganisms and other organisms living in and on the soil). Best management practices (BMPs) must be followed to assure continued successful agricultural production with minimum consequences (limited nitrate leaching or pesticide contamination of ground waters). The value of prime farm land must be recognized and appreciated.

In the semi-arid portions of the U.S., erosion due to the wind dominates. In these areas, windbreaks and shelter belts are constructed using trees and shrubs. On the open prairies, wheat is planted in swaths perpendicular to the wind to reduce soil loss by high winds.

The presence of rare or endangered species on agricultural lands is increasingly pitting farmers and ranchers against those with a concern for the ecosystem and the environment.

Forest, Range, Water, and Wildlife uses

Wildlife require necessary food and water sources plus protective cover among trees and shrubs.

Rangelands have been abused by keeping livestock on a single parcel of land for too long a period. Modern ranchers understand the importance of rotating livestock around on various portions of the land, rather than allowing the animals to remain on the land 365 days a year.

Range land management requires planning to control undesirable plants on the range along with potential re-seeding plus rotational grazing systems to reduce compaction and soil erosion. Timber management includes siting of road locations to minimize soil erosion. Clear-cutting practices increase soil erosion; thus, proper land management decisions require sensitivity to and awareness of the need to leave the forest debris on the ground after clear-cutting to prevent excessive soil erosion. However, this timber debris is a fire hazard and may cause problems for replanting the land. Livestock grazing will need to be controlled until the trees are beyond the stage where they would be killed by animal grazing. Fertilizer applications on steep forested land may result in fertilizer movement into adjacent streams on steeply sloping landscapes.

Soil erosion into streams in mountainous areas has damaged many fish spawning areas. Natural habitat restoration is needed to ensure logging or mining activities in mountainous regions do not adversely impact stream water quality. Wildlife habitat management is increasingly seen as an important facet of wise land use planning. This must be based upon an entire ecosystem approach where soil is only one component of the entire management process.

Most forest and rangelands serve as watersheds that provide substantial amounts of surface water collected into dams and reservoirs for irrigation or for municipal water uses. The soils must be protected to ensure the water is of the highest quality. Also, eroding soil must be prevented from entering these dams and reservoirs. The eroded sediments would otherwise settle behind the dam or reservoir, reducing the total volume of water that could be held by the dam or reservoir.

Recreational uses

Steep slopes are inappropriate for campsites. Stone-free sites are most desirable for camping. Steep slopes are essential for ski runs in mountainous areas. Mountainous terrain is desirable for vistas and viewing while hiking. Hiking trails are prone to severe erosion and special attention must be paid to diverting water effectively from the trail.

Urban Planners

Urban planners need soil information to assist in planning future urban growth and areas for future expansion. This includes considerations for future open space preservation, water drainage and water recharge locations, and other specific local soil concerns. They must consider the importance of protecting agricultural land as prime farmland for future generations. Often, urban communities are sensitive to the need for aesthetic conditions such as green belts and parks. Stream beds and poorly drained areas can often be developed for green belts and avoid the damage created by constructing buildings or highways on these poorly drained areas.

Soil engineering properties are particularly of concern relative to construction sites. Storm water runoff, sewage water treatment, and promoting clean air and water are important soil functions to consider when making urban plans. The spatial relationships of the soils and the native vegetation patterns are of primary importance relative to parks, playgrounds, golf courses, poorly drained areas, green belts and other open spaces. An assessment of the local geology and natural resources plus existing highways, railroads, rivers, and other transportation routes must be included in any long-term plan.

Zoning Regulations

Almost every proposed land use will have some conflicting use as viewed by various members of the community. Consequently, all land use decisions are hotly debated political issues. These issues usually are described as zoning decisions. Libertarians want the government to have no role in any aspect of their lives. On the other side are various specific interest groups and environmental groups advocating the government must intervene to protect the soil for future generations. Poorly drained areas (flood plains) must be avoided for most human habitation. Steep hillsides which are prone to slope failures must be avoided for housing developments. Poorly drained and wet soils are not suitable for individual home septic tanks. Zoning maps are commonly developed delineating areas with severe or hazardous conditions for potential zoning.

The needs associated with an increase in population and growth must be balanced with the availability of existing and projected expansion of possible resources available to serve this increase in population. The rights of property owners and farmers to sell their land must be balanced against a higher good to the community to preserve or protect such land for future generations.

Construction of Buildings, Pipelines, and Highways

If soils are strongly acidic, the concrete foundations of buildings may corrode. Withdrawing ground water from areas with a high shrink and swell potential may cause cracking of the building foundation. Often, buildings are constructed in river flood plains where the water may only rise 1 in 20 or fewer years. Flooding can cause severe damage to such structures.

Knowledge of soil engineering properties is essential for any decisions relative to siting various structures on the soil. These properties include the depth of the major soil horizons, the liquid limit, plastic limit, plasticity index, maximum dry bulk density, optimum moisture content, mechanical analysis (texture), AASHTO and Unified classifications of soil characteristics, water percolation rate, soil bearing strength, the shrink-swell ratio, the soil pH, the depth to the water table and depth to bedrock.

Buried pipelines in soils are subjected to severe corrosion associated with high salt content of soils, strong acidity conditions or to poorly drained soil environments.

Highways require a stable base on the soil. Frequently, poorly drained areas can result in frost susceptibility of pavement and later pothole development. In some circumstances, the soil may be too soft or to unstable and may have to be removed and replaced with more appropriate fill earth material prior to construction. Some soils will settle unevenly resulting in bumps in the roadbed.

Problems with Land Use Planning

Commonly recognized problems include urban sprawl, fragmentation of rural and urban land parcels, over-development, inadequate attention to the need for open space, inflation, and increasing tax valuation of the land. These problems arise mainly because decisions are based solely on political processes or because major constituent groups and stake holders have been ignored in the planning process. Planning takes time. Often, people are in too great a hurry to complete a plan with the consequence of having considered only some (but not all) of the critical factors necessary to make a fully informed decision relative to the use of a particular parcel of land.

Frequently, the reclassification of using land from agricultural to residential has the consequence of eventually driving farmers off their land. People have a romantic ideal of rural life. However, the new homeowners complain about the smell or noise of livestock production or the potential threat from pesticide drift when the grower applies pesticides to the crops. In addition, the tax valuation of land adjacent to agricultural land is often reclassified thus making the land tax more than the profit per acre that can be obtained by the farmer or rancher continuing to operate as they have in the past.

Future land use decisions will need to include a greater consideration for the limited natural resources (soil, air, and water) along with a deeper appreciation of the environment and the ecological relationships of all organisms (including humans) within the ecosystem. Society will have to embrace a better understanding and recognition of the importance of sustainable practices rather than the extremely high energy expenditures and horrendous water waste which occurs with many current products and practices. Population restrictions or other limitations may be required as the society continues to grow in unplanned and unanticipated ways.

References

Bartelli, L. J., A. A. Klingebiel, J. V. Baird and M. R. Heddleson. 1966. Soil surveys and land use planning. Soil Science Society of America and American Society of Agronomy. Madison, WI.

Beatty, Marvin T., Gary W. Petersen, and Lester D. Swindale. 1979. Planning the uses and management of land. Agronomy 21. American Society of Agronomy, Crop Science Society of America, Soil Science Society of America, Inc. Madison, WI.

This page titled 11.1: Information and Activity is shared under a CC BY 4.0 license and was authored, remixed, and/or curated by Anna R. Schwyter & Karen L. Vaughan (UW Open Education Resources (OER)) via source content that was edited to the style and standards of the LibreTexts platform.

Index

A

Abney level
- 9.7: Slope and Runoff

aggregation
- 5.5: Porosity

argillic horizon
- 9.4: Time

C

carbon cycle
- 10.1: Microbial Activity and the Carbon Cycle

clinometer
- 9.7: Slope and Runoff

D

dynamic soil quality
- 8.1: Introduction to Soil Health

E

epipedon
- 9.5: Soil Classification

H

humus
- 10.2: Humus

hygroscopic water
- 5.7: Soil-Water Relations

I

inherent soil quality
- 8.1: Introduction to Soil Health

inoculation
- 10.3: Soil Microorganisms

M

mineralization
- 10.4: Mineralization

P

Particle density
- 5.4: Particle Density

pedogenesis
- 2.1: Introduction

permanent wilting point
- 5.7: Soil-Water Relations

pore size distribution
- 5.5: Porosity

S

slake test
- 8.2: Activity 1 - Aggregate Stability

soil charge
- 7.1: Introduction

soil colloids
- 7.1: Introduction

soil permeability
- 9.8: Soil Permeability

surface water runoff
- 9.7: Slope and Runoff

W

Wycolo series
- 9.9: Laramie's Local Soils

Glossary

Sample Word 1 | Sample Definition 1

Detailed Licensing

Overview

Title: Introduction to Soil Science Laboratory Manual (Schwyter and Vaughan)

Webpages: 90

All licenses found:

- CC BY 4.0: 96.7% (87 pages)
- Undeclared: 3.3% (3 pages)

By Page

- Introduction to Soil Science Laboratory Manual (Schwyter and Vaughan) - *CC BY 4.0*
  - Front Matter - *CC BY 4.0*
    - Title Page - *CC BY 4.0*
    - InfoPage - *CC BY 4.0*
    - Table of Contents - *Undeclared*
    - Licensing - *Undeclared*
  - 1: Introduction to Soil Science and Soil Formation - *CC BY 4.0*
    - 1.1: Introduction - *CC BY 4.0*
    - 1.2: Activity 1 - Soil Formation - *CC BY 4.0*
    - 1.3: Activity 2 - Soil Horizons - *CC BY 4.0*
    - 1.4: Activity 3 - Soil Color - *CC BY 4.0*
    - 1.5: Activity 4 - Soil Texture - *CC BY 4.0*
    - 1.6: Activity 5 - Soil Structure - *CC BY 4.0*
  - 2: Parent Materials and Mineralogy - *CC BY 4.0*
    - 2.1: Introduction - *CC BY 4.0*
    - 2.2: Activity 2 - Minerals - *CC BY 4.0*
    - 2.3: Activity 2 - Rocks - *CC BY 4.0*
    - 2.4: Activity 3 - Weathering - *CC BY 4.0*
    - 2.5: Activity 4- Rocks to Parent Material - *CC BY 4.0*
  - 3: Soil Taxonomy - *CC BY 4.0*
    - 3.1: Introduction to Soil Taxonomy - *CC BY 4.0*
    - 3.2: Pre-Class Activity- Classified Location Exercise - *CC BY 4.0*
    - 3.3: Activity 1- Horizons and Characteristics - *CC BY 4.0*
    - 3.4: Activity 2 - Taxonomic Class - *CC BY 4.0*
  - 4: Soil Survey and Mapping - *CC BY 4.0*
    - 4.1: Introduction- Soil Survey Reports - *CC BY 4.0*
    - 4.2: What is a soil survey? - *CC BY 4.0*
    - 4.3: Challenges in soil surveying - *CC BY 4.0*
    - 4.4: Responsibility for soil surveys - *CC BY 4.0*
    - 4.5: Activity 1 - Using Web Soil Survey - *CC BY 4.0*
  - 5: Soil Physical Properties & Soil-Water Relations - *CC BY 4.0*
    - 5.1: Introduction- Soil Texture, Structure and Water Relations - *CC BY 4.0*
    - 5.2: Bulk Density, Porosity, Particle Density of Soil - *CC BY 4.0*
    - 5.3: Bulk Density - *CC BY 4.0*
    - 5.4: Particle Density - *CC BY 4.0*
    - 5.5: Porosity - *CC BY 4.0*
    - 5.6: Sampling - *CC BY 4.0*
    - 5.7: Soil-Water Relations - *CC BY 4.0*
    - 5.8: Soil Erosion - *CC BY 4.0*
    - 5.9: Activity 1 - Bulk Density and Porosity of Soil Cores - *CC BY 4.0*
    - 5.10: Activity 2 - Soil Moisture - *CC BY 4.0*
    - 5.11: Activity 3 - Soil Water Movement - *CC BY 4.0*
    - 5.12: Activity 4 - Infiltration Estimates and Available Water Calculations - *CC BY 4.0*
    - 5.13: Activity 5 - Effects of Soil Erosion - *CC BY 4.0*
  - 6: Science Communication - *CC BY 4.0*
    - 6.1: Introduction - *CC BY 4.0*
    - 6.2: Activity - *CC BY 4.0*
  - 7: Soil Chemistry - *CC BY 4.0*
    - 7.1: Introduction - *CC BY 4.0*
    - 7.2: Activity 1 - Soil Colloids - *CC BY 4.0*
    - 7.3: Activity 2 - Soil Charge - *CC BY 4.0*
    - 7.4: Activity 3 - Soil Charge Calculations - *CC BY 4.0*
    - 7.5: Activity 4 - Soil pH and Electrical Conductivity - *CC BY 4.0*
    - 7.6: Activity 5 - Reduction and Oxidation Reactions - *CC BY 4.0*
  - 8: Soil Health & Quality - *CC BY 4.0*
    - 8.1: Introduction to Soil Health - *CC BY 4.0*
    - 8.2: Activity 1 - Aggregate Stability - *CC BY 4.0*
    - 8.3: Activity 2- Nutrient Cycling and Availability - *CC BY 4.0*

- 8.4: Activity 3 - Soil Nitrate - *CC BY 4.0*
- 8.5: Activity 4 - Fertilizer Calculations - *CC BY 4.0*

- 9: Field Lab - *CC BY 4.0*
  - 9.1: OVERVIEW - *CC BY 4.0*
  - 9.2: Climate - *CC BY 4.0*
  - 9.3: Relief - *CC BY 4.0*
  - 9.4: Time - *CC BY 4.0*
  - 9.5: Soil Classification - *CC BY 4.0*
  - 9.6: Soil Orders - *CC BY 4.0*
  - 9.7: Slope and Runoff - *CC BY 4.0*
  - 9.8: Soil Permeability - *CC BY 4.0*
  - 9.9: Laramie's Local Soils - *CC BY 4.0*
  - 9.10: Activity 1 - Soil Formation - *CC BY 4.0*
- 10: Soil Ecology - *CC BY 4.0*
  - 10.1: Microbial Activity and the Carbon Cycle - *CC BY 4.0*
  - 10.2: Humus - *CC BY 4.0*
  - 10.3: Soil Microorganisms - *CC BY 4.0*
  - 10.4: Mineralization - *CC BY 4.0*
  - 10.5: Carbon/Nitrogen Ratio - *CC BY 4.0*
  - 10.6: Nitrogen Cycle - *CC BY 4.0*
  - 10.7: Major components of the Nitrogen Cycle - *CC BY 4.0*
  - 10.8: Activity 1 - Soil Incubation - *CC BY 4.0*
  - 10.9: Activity 2 - Carbon Dioxide - *CC BY 4.0*
  - 10.10: Activity 3 - Soil Nitrate-Nitrogen Analysis - *CC BY 4.0*
  - 10.11: Activity 4 - Decomposition Questions - *CC BY 4.0*
  - 10.12: Activity 5 - Winogradsky Columns - *CC BY 4.0*
- 11: Makeup Lab: Land Use - *CC BY 4.0*
  - 11.1: Information and Activity - *CC BY 4.0*
- Back Matter - *CC BY 4.0*
  - Index - *CC BY 4.0*
  - Glossary - *CC BY 4.0*
  - Detailed Licensing - *Undeclared*