CHEM 107 GENERAL CHEMISTRY FOR APPLIED SCIENCES

OpenStax

LibreTexts™

OpenStax CNX

Map: Chemistry - Atoms First (OpenSTAX)

Paul Flowers, Klaus Theopold & Richard Langley via OpenStax

This text is disseminated via the Open Education Resource (OER) LibreTexts Project (https://LibreTexts.org) and like the thousands of other texts available within this powerful platform, it is freely available for reading, printing, and "consuming."

The LibreTexts mission is to bring together students, faculty, and scholars in a collaborative effort to provide an accessible, and comprehensive platform that empowers our community to develop, curate, adapt, and adopt openly licensed resources and technologies; through these efforts we can reduce the financial burden born from traditional educational resource costs, ensuring education is more accessible for students and communities worldwide.

Most, but not all, pages in the library have licenses that may allow individuals to make changes, save, and print this book. Carefully consult the applicable license(s) before pursuing such effects. Instructors can adopt existing LibreTexts texts or Remix them to quickly build course-specific resources to meet the needs of their students. Unlike traditional textbooks, LibreTexts' web based origins allow powerful integration of advanced features and new technologies to support learning.

LibreTexts is the adaptable, user-friendly non-profit open education resource platform that educators trust for creating, customizing, and sharing accessible, interactive textbooks, adaptive homework, and ancillary materials. We collaborate with individuals and organizations to champion open education initiatives, support institutional publishing programs, drive curriculum development projects, and more.

The LibreTexts libraries are Powered by NICE CXone Expert and was supported by the Department of Education Open Textbook Pilot Project, the California Education Learning Lab, the UC Davis Office of the Provost, the UC Davis Library, the California State University Affordable Learning Solutions Program, and Merlot. This material is based upon work supported by the National Science Foundation under Grant No. 1246120, 1525057, and 1413739.

Any opinions, findings, and conclusions or recommendations expressed in this material are those of the author(s) and do not necessarily reflect the views of the National Science Foundation nor the US Department of Education.

Have questions or comments? For information about adoptions or adaptions contact info@LibreTexts.org or visit our main website at https://LibreTexts.org.

This text was compiled on 03/11/2026

TABLE OF CONTENTS

Licensing

1: Essential Ideas of Chemistry

- 1.1: Chemistry in Context
- 1.2: Phases and Classification of Matter
- 1.3: Physical and Chemical Properties
- 1.4: Measurements
- 1.5: Measurement Uncertainty, Accuracy, and Precision
- 1.6: Mathematical Treatment of Measurement Results
- Appendix 1: Essential Mathematics Review

2: Atoms, Molecules, and Ions

- 2.1: Atomic Structure and Symbolism
- 2.2: Chemical Formulas
- 2.3: The Periodic Table
- 2.4: Molecular and Ionic Compounds
- 2.5: Chemical Nomenclature

3: Composition of Substances and Solutions

- 3.1: Formula Mass and the Mole Concept
- 3.2: Determining Empirical and Molecular Formulas
- 3.3: Molarity
- 3.4: Other Units for Solution Concentrations

4: Stoichiometry of Chemical Reactions

- 4.1: Prelude to Stoichiometry
- 4.2: Writing and Balancing Chemical Equations
- 4.3: Classifying Chemical Reactions
- 4.4: Reaction Stoichiometry
- 4.5: Reaction Yields
- 4.6: Quantitative Chemical Analysis

5: Thermochemistry

- 5.1: Prelude to Thermochemistry
- 5.2: Energy Basics
- 5.3: Calorimetry
- 5.4: Enthalpy

6: Electronic Structure and Periodic Properties

- 6.1: The Bohr Model
- 6.2: Development of Quantum Theory
- 6.3: Electronic Structure of Atoms (Electron Configurations)
- 6.4: Periodic Variations in Element Properties

7: Chemical Bonding and Molecular Geometry

- 7.1: Prelude to Chemical Bonding and Molecular Geometry
- 7.2: Ionic Bonding
- 7.3: Covalent Bonding
- 7.4: Lewis Symbols and Structures
- 7.5: Formal Charges and Resonance
- 7.6: Molecular Structure and Polarity
- 7.7: Chemical Bonding and Molecular Geometry (Exercises)

8: Gases

- 8.1: Gas Pressure
- 8.2: The Ideal Gas Law
- 8.3: Stoichiometry of Gaseous Substances, Mixtures, and Reactions
- 8.4: Effusion and Diffusion of Gases
- 8.5: The Kinetic-Molecular Theory

9: Liquids and Solids

- 9.1: Prelude to Liquids and Solids
- 9.2: Intermolecular Forces
- 9.3: Properties of Liquids
- 9.4: Phase Transitions
- 9.5: The Solid State of Matter

10: Solutions

- 10.1: The Dissolution Process
- 10.2: Electrolytes
- 10.3: Solubility
- 10.4: Colligative Properties
- 10.5: Colloids

11: Kinetics

- 11.1: Prelude to Kinetics
- 11.2: Chemical Reaction Rates
- 11.3: Factors Affecting Reaction Rates
- 11.4: Collision Theory
- 11.5: Catalysis

12: Fundamental Equilibrium Concepts

- 12.1: Prelude to Equilibrium
- 12.2: Chemical Equilibria
- 12.3: Equilibrium Constants
- 12.4: Shifting Equilibria: Le Châtelier’s Principle
- 12.5: Equilibrium Calculations
- 12.6: Fundamental Equilibrium Concepts (Exercises)

13: Acid-Base Equilibria

- 13.1: Brønsted-Lowry Acids and Bases
- 13.2: pH and pOH
- 13.3: Relative Strengths of Acids and Bases
- 13.4: Hydrolysis of Salt Solutions
- 13.5: Polyprotic Acids
- 13.6: Buffers
- 13.7: Acid-Base Titrations
- 13.8: Acid-Base Equilibria (Exercises)

14: Nuclear Chemistry

- 14.1: Nuclear Structure and Stability
- 14.2: Nuclear Equations
- 14.3: Radioactive Decay
- 14.4: Transmutation and Nuclear Energy
- 14.5: Uses of Radioisotopes
- 14.6: Biological Effects of Radiation
- 14.7: Nuclear Chemistry (Exercises)

15: Appendices

- 15.1: Composition of Commercial Acids and Bases
- 15.2: Fundamental Physical Constants
- 15.3: The Periodic Table
- 15.4: Units and Conversion Factors
- 15.5: Water Properties

Index

Glossary

Detailed Licensing

Licensing

*A detailed breakdown of this resource's licensing can be found in **Back Matter/Detailed Licensing**.*

CHAPTER OVERVIEW

1: Essential Ideas of Chemistry

A general chemistry Libretexts Textmap organized around the textbook
General Chemistry -Atoms First
By OpenStax

I II III IV V VI VII VIII IX X XI XII XIII XIV XV XVI XVII XVIII XIX XX XXI ● **Homework**

Most everything you do and encounter during your day involves chemistry. Making coffee, cooking eggs, and toasting bread involve chemistry. The products you use—like soap and shampoo, the fabrics you wear, the electronics that keep you connected to your world, the gasoline that propels your car—all of these and more involve chemical substances and processes. Whether you are aware or not, chemistry is part of your everyday world. In this course, you will learn many of the essential principles underlying the chemistry of modern-day life.

Topic hierarchy

1.1: Chemistry in Context
1.2: Phases and Classification of Matter
1.3: Physical and Chemical Properties
1.4: Measurements
1.5: Measurement Uncertainty, Accuracy, and Precision
1.6: Mathematical Treatment of Measurement Results
Appendix 1: Essential Mathematics Review

Contributors

- Paul Flowers (University of North Carolina - Pembroke), Klaus Theopold (University of Delaware) and Richard Langley (Stephen F. Austin State University) with contributing authors. Textbook content produced by OpenStax College is licensed under a Creative Commons Attribution License 4.0 license. Download for free at http://cnx.org/contents/85abf193-2bd...a7ac8df6@9.110).

This page titled 1: Essential Ideas of Chemistry is shared under a CC BY license and was authored, remixed, and/or curated by OpenStax.

1.1: Chemistry in Context

Skills to Develop

- Outline the historical development of chemistry
- Provide examples of the importance of chemistry in everyday life
- Describe the scientific method
- Differentiate among hypotheses, theories, and laws
- Provide examples illustrating macroscopic, microscopic, and symbolic domains

Throughout human history, people have tried to convert matter into more useful forms. Our Stone Age ancestors chipped pieces of flint into useful tools and carved wood into statues and toys. These endeavors involved changing the shape of a substance without changing the substance itself. But as our knowledge increased, humans began to change the composition of the substances as well—clay was converted into pottery, hides were cured to make garments, copper ores were transformed into copper tools and weapons, and grain was made into bread.

Humans began to practice chemistry when they learned to control fire and use it to cook, make pottery, and smelt metals. Subsequently, they began to separate and use specific components of matter. A variety of drugs such as aloe, myrrh, and opium were isolated from plants. Dyes, such as indigo and Tyrian purple, were extracted from plant and animal matter. Metals were combined to form alloys—for example, copper and tin were mixed together to make bronze—and more elaborate smelting techniques produced iron. Alkalis were extracted from ashes, and soaps were prepared by combining these alkalis with fats. Alcohol was produced by fermentation and purified by distillation.

Attempts to understand the behavior of matter extend back for more than 2500 years. As early as the sixth century BC, Greek philosophers discussed a system in which water was the basis of all things. You may have heard of the Greek postulate that matter consists of four elements: earth, air, fire, and water. Subsequently, an amalgamation of chemical technologies and philosophical speculations were spread from Egypt, China, and the eastern Mediterranean by alchemists, who endeavored to transform “base metals” such as lead into “noble metals” like gold, and to create elixirs to cure disease and extend life (Figure **1.1.1**).

Figure **1.1.1**: This portrayal shows an alchemist’s workshop circa 1580. Although alchemy made some useful contributions to how to manipulate matter, it was not scientific by modern standards. (credit: Chemical Heritage Foundation).

From alchemy came the historical progressions that led to modern chemistry: the isolation of drugs from natural sources, metallurgy, and the dye industry. Today, chemistry continues to deepen our understanding and improve our ability to harness and control the behavior of matter. This effort has been so successful that many people do not realize either the central position of chemistry among the sciences or the importance and universality of chemistry in daily life.

Chemistry: The Central Science

Chemistry is sometimes referred to as “the central science” due to its interconnectedness with a vast array of other STEM disciplines (STEM stands for areas of study in the science, technology, engineering, and math fields). Chemistry and the language of chemists play vital roles in biology, medicine, materials science, forensics, environmental science, and many other fields (Figure **1.1.2**). The basic principles of physics are essential for understanding many aspects of chemistry, and there is extensive overlap between many subdisciplines within the two fields, such as chemical physics and nuclear chemistry. Mathematics, computer science, and information theory provide important tools that help us calculate, interpret, describe, and generally make sense of the chemical world. Biology and chemistry converge in biochemistry, which is crucial to understanding the many complex factors and processes that keep living organisms (such as us) alive. Chemical engineering, materials science, and nanotechnology combine chemical principles and empirical findings to produce useful substances, ranging from gasoline to fabrics to electronics. Agriculture, food science, veterinary science, and brewing and wine making help provide sustenance in the form of food and drink to the world’s population. Medicine, pharmacology, biotechnology, and botany identify and produce substances that help keep us healthy. Environmental science, geology, oceanography, and atmospheric science incorporate many chemical ideas to help us better understand and protect our physical world. Chemical ideas are used to help understand the universe in astronomy and cosmology.

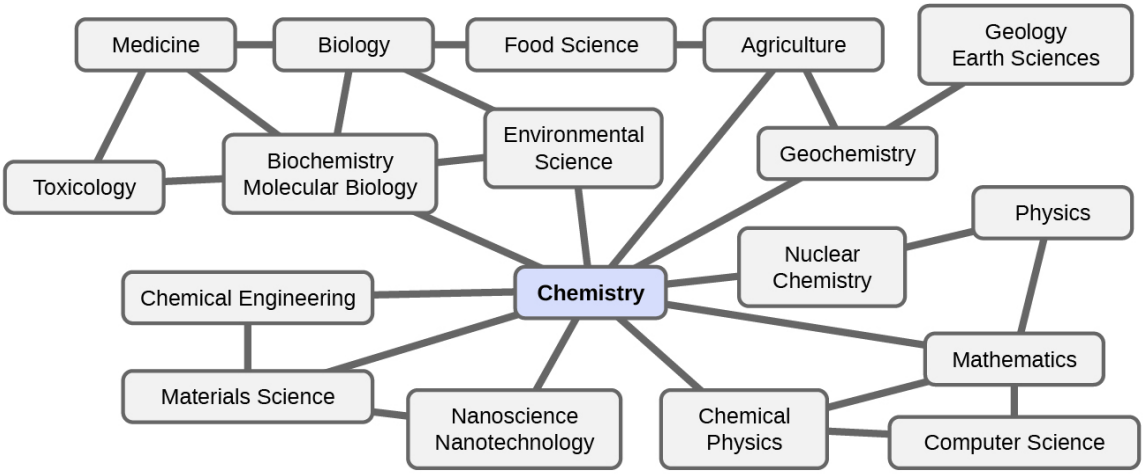

Figure **1.1.2**: Knowledge of chemistry is central to understanding a wide range of scientific disciplines. This diagram shows just some of the interrelationships between chemistry and other fields.

What are some changes in matter that are essential to daily life? Digesting and assimilating food, synthesizing polymers that are used to make clothing, containers, cookware, and credit cards, and refining crude oil into gasoline and other products are just a few examples. As you proceed through this course, you will discover many different examples of changes in the composition and structure of matter, how to classify these changes and how they occurred, their causes, the changes in energy that accompany them, and the principles and laws involved. As you learn about these things, you will be learning chemistry, the study of the composition, properties, and interactions of matter. The practice of chemistry is not limited to chemistry books or laboratories: It happens whenever someone is involved in changes in matter or in conditions that may lead to such changes.

The Scientific Method

Chemistry is a science based on observation and experimentation. Doing chemistry involves attempting to answer questions and explain observations in terms of the laws and theories of chemistry, using procedures that are accepted by the scientific community. There is no single route to answering a question or explaining an observation, but there is an aspect common to every approach: Each uses knowledge based on experiments that can be reproduced to verify the results. Some routes involve a hypothesis, a tentative explanation of observations that acts as a guide for gathering and checking information. We test a hypothesis by experimentation, calculation, and/or comparison with the experiments of others and then refine it as needed.

Some hypotheses are attempts to explain the behavior that is summarized in laws. The laws of science summarize a vast number of experimental observations, and describe or predict some facet of the natural world. If such a hypothesis turns out to be capable of explaining a large body of experimental data, it can reach the status of a theory. Scientific theories are well-substantiated, comprehensive, testable explanations of particular aspects of nature. Theories are accepted because they provide satisfactory

explanations, but they can be modified if new data become available. The path of discovery that leads from question and observation to law or hypothesis to theory, combined with experimental verification of the hypothesis and any necessary modification of the theory, is called the scientific method (Figure **1.1.3**).

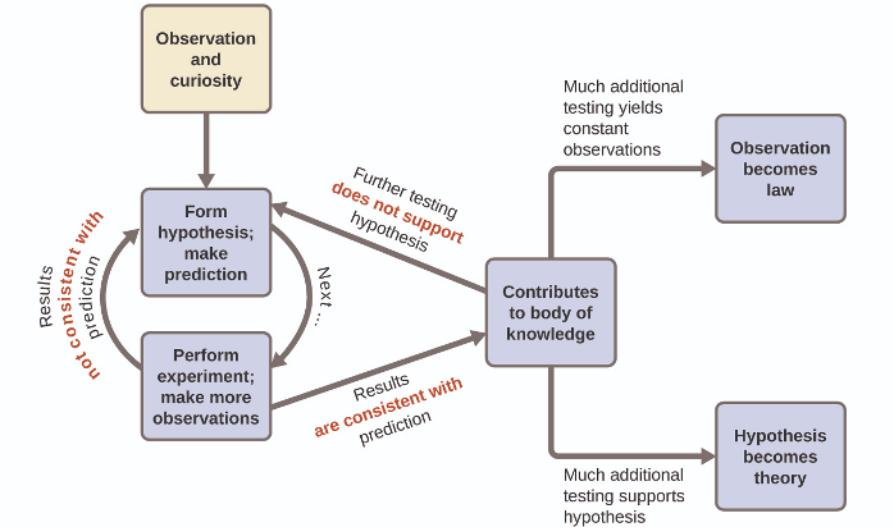

Figure **1.1.3**: The scientific method follows a process similar to the one shown in this diagram. All the key components are shown, in roughly the right order. Scientific progress is seldom neat and clean: It requires open inquiry and the reworking of questions and ideas in response to findings.

Key Concepts and Summary

Chemistry deals with the composition, structure, and properties of matter, and the ways by which various forms of matter may be interconverted. Thus, it occupies a central place in the study and practice of science and technology. Chemists use the scientific method to perform experiments, pose hypotheses, and formulate laws and develop theories, so that they can better understand the behavior of the natural world. To do so, they operate in the macroscopic, microscopic, and symbolic domains. Chemists measure, analyze, purify, and synthesize a wide variety of substances that are important to our lives.

Glossary

chemistry
study of the composition, properties, and interactions of matter

hypothesis
tentative explanation of observations that acts as a guide for gathering and checking information

law
statement that summarizes a vast number of experimental observations, and describes or predicts some aspect of the natural world

scientific method
path of discovery that leads from question and observation to law or hypothesis to theory, combined with experimental verification of the hypothesis and any necessary modification of the theory

theory
well-substantiated, comprehensive, testable explanation of a particular aspect of nature

Contributors

- Paul Flowers (University of North Carolina - Pembroke), Klaus Theopold (University of Delaware) and Richard Langley (Stephen F. Austin State University) with contributing authors. Textbook content produced by OpenStax College is licensed under a Creative Commons Attribution License 4.0 license. Download for free at http://cnx.org/contents/85abf193-2bd...a7ac8df6@9.110).

This page titled 1.1: Chemistry in Context is shared under a CC BY license and was authored, remixed, and/or curated by OpenStax.

1.2: Phases and Classification of Matter

Learning Objectives

- Describe the basic properties of each physical state of matter: solid, liquid, and gas.
- Define and give examples of atoms and molecules.
- Classify matter as an element, compound, homogeneous mixture, or heterogeneous mixture with regard to its physical state and composition.
- Use symbolic, particulate, or macroscopic representations to describe or classify the different types of matter.
- Distinguish between mass and weight.
- Apply the law of conservation of matter.

Matter is defined as anything that occupies space and has mass, and it is all around us. Solids and liquids are more obviously matter: We can see that they take up space, and their weight tells us that they have mass. Gases are also matter; if gases did not take up space, a balloon would stay collapsed rather than inflate when filled with gas.

Solids, liquids, and gases are the three states of matter commonly found on earth (Figure **1.2.1**). A solid is rigid and possesses a definite shape. A liquid flows and takes the shape of a container, except that it forms a flat or slightly curved upper surface when acted upon by gravity. (In zero gravity, liquids assume a spherical shape.) Both liquid and solid samples have volumes that are very nearly independent of pressure. A gas takes both the shape and volume of its container.

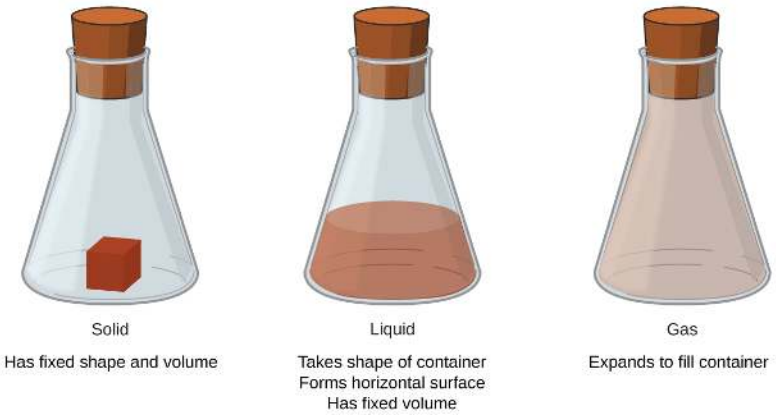

Figure **1.2.1**: The three most common states or phases of matter are solid, liquid, and gas.

A beaker labeled solid contains a cube of red matter and says has fixed shape and volume. A beaker labeled liquid contains a brownish-red colored liquid. This beaker says takes shape of container, forms horizontal surfaces, has fixed volume. The beaker labeled gas is filled with a light brown gas. This beaker says expands to fill container.

A fourth state of matter, plasma, occurs naturally in the interiors of stars. A plasma is a gaseous state of matter that contains appreciable numbers of electrically charged particles (Figure **1.2.2**). The presence of these charged particles imparts unique properties to plasmas that justify their classification as a state of matter distinct from gases. In addition to stars, plasmas are found in some other high-temperature environments (both natural and man-made), such as lightning strikes, certain television screens, and specialized analytical instruments used to detect trace amounts of metals.

Figure 1.2.2: A plasma torch can be used to cut metal. (credit: “Hypertherm”/Wikimedia Commons)

A cutting torch is being used to cut a piece of metal. Bright, white colored plasma can be seen near the tip of the torch, where it is contacting the metal.

Video* 1.2.1: In a tiny cell in a plasma television, the plasma emits ultraviolet light, which in turn causes the display at that location to appear a specific color. The composite of these tiny dots of color makes up the image that you see. Watch this video to learn more about plasma and the places you encounter it.*

Some samples of matter appear to have properties of solids, liquids, and/or gases at the same time. This can occur when the sample is composed of many small pieces. For example, we can pour sand as if it were a liquid because it is composed of many small grains of solid sand. Matter can also have properties of more than one state when it is a mixture, such as with clouds. Clouds appear to behave somewhat like gases, but they are actually mixtures of air (gas) and tiny particles of water (liquid or solid).

The mass of an object is a measure of the amount of matter in it. One way to measure an object’s mass is to measure the force it takes to accelerate the object. It takes much more force to accelerate a car than a bicycle because the car has much more mass. A more common way to determine the mass of an object is to use a balance to compare its mass with a standard mass.

Although weight is related to mass, it is not the same thing. Weight refers to the force that gravity exerts on an object. This force is directly proportional to the mass of the object. The weight of an object changes as the force of gravity changes, but its mass does not. An astronaut’s mass does not change just because she goes to the moon. But her weight on the moon is only one-sixth her earth-bound weight because the moon’s gravity is only one-sixth that of the earth’s. She may feel “weightless” during her trip when she experiences negligible external forces (gravitational or any other), although she is, of course, never “massless.”

The law of conservation of matter summarizes many scientific observations about matter: It states that *there is no detectable change in the total quantity of matter present when matter converts from one type to another (a chemical change) or changes among solid, liquid, or gaseous states (a physical change)*. Brewing beer and the operation of batteries provide examples of the conservation of matter (Figure 1.2.4). During the brewing of beer, the ingredients (water, yeast, grains, malt, hops, and sugar) are converted into beer (water, alcohol, carbonation, and flavoring substances) with no actual loss of substance. This is most clearly seen during the bottling process, when glucose turns into ethanol and carbon dioxide, and the total mass of the substances does not change. This can also be seen in a lead-acid car battery: The original substances (lead, lead oxide, and sulfuric acid), which are

capable of producing electricity, are changed into other substances (lead sulfate and water) that do not produce electricity, with no change in the actual amount of matter.

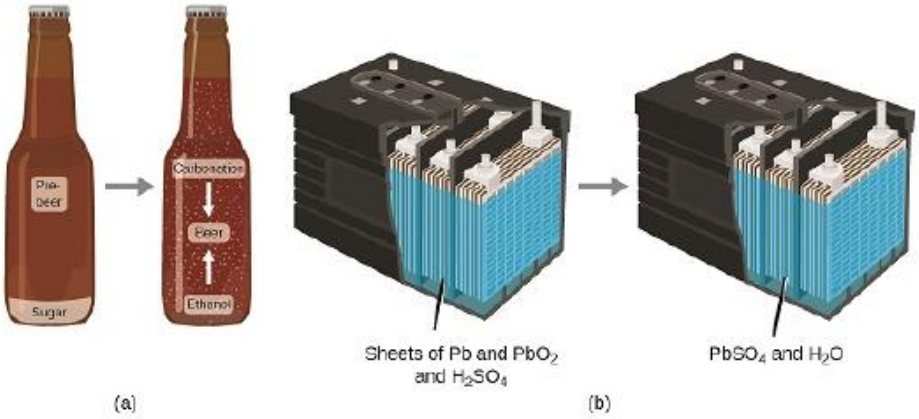

Figure **1.2.3**: (a) The mass of beer precursor materials is the same as the mass of beer produced: Sugar has become alcohol and carbonation. (b) The mass of the lead, lead oxide plates, and sulfuric acid that goes into the production of electricity is exactly equal to the mass of lead sulfate and water that is formed.

Diagram A shows a beer bottle containing pre-beer and sugar. An arrow points from this bottle to a second bottle. This second bottle contains the same volume of liquid, however, the sugar has been converted into ethanol and carbonation as beer was made. Diagram B shows a car battery that contains sheets of P B and P B O subscript 2 along with H subscript 2 S O subscript 4. After the battery is used, it contains an equal mass of P B S O subscript 4 and H subscript 2 O.

Although this conservation law holds true for all conversions of matter, convincing examples are few and far between because, outside of the controlled conditions in a laboratory, we seldom collect all of the material that is produced during a particular conversion. For example, when you eat, digest, and assimilate food, all of the matter in the original food is preserved. But because some of the matter is incorporated into your body, and much is excreted as various types of waste, it is challenging to verify by measurement.

Atoms and Molecules

An atom is the smallest particle of an element that has the properties of that element and can enter into a chemical combination. Consider the element gold, for example. Imagine cutting a gold nugget in half, then cutting one of the halves in half, and repeating this process until a piece of gold remained that was so small that it could not be cut in half (regardless of how tiny your knife may be). This minimally sized piece of gold is an atom (from the Greek *atomos*, meaning “indivisible”) (Figure 1.2.4). This atom would no longer be gold if it were divided any further.



Figure **1.2.4**: (a) This photograph shows a gold nugget. (b) A scanning-tunneling microscope (STM) can generate views of the surfaces of solids, such as this image of a gold crystal. Each sphere represents one gold atom. (credit a: modification of work by United States Geological Survey; credit b: modification of work by “Erwinrossen”/Wikimedia Commons)

Figure A shows a gold nugget as it would appear to the naked eye. The gold nugget is very irregular, with many sharp edges. It appears gold in color. The microscope image of a gold crystal shows many similarly sized gold stripes that are separated by dark areas. Looking closely, one can see that the gold stripes are made of many, tiny, circular atoms.

The first suggestion that matter is composed of atoms is attributed to the Greek philosophers Leucippus and Democritus, who developed their ideas in the 5th century BCE. However, it was not until the early nineteenth century that John Dalton (1766–1844), a British schoolteacher with a keen interest in science, supported this hypothesis with quantitative measurements. Since that time, repeated experiments have confirmed many aspects of this hypothesis, and it has become one of the central theories of chemistry.

Other aspects of Dalton's atomic theory are still used but with minor revisions (details of Dalton's theory are provided in the chapter on atoms and molecules).

An atom is so small that its size is difficult to imagine. One of the smallest things we can see with our unaided eye is a single thread of a spider web: These strands are about 1/10,000 of a centimeter (0.0001 cm) in diameter. Although the cross-section of one strand is almost impossible to see without a microscope, it is huge on an atomic scale. A single carbon atom in the web has a diameter of about 0.000000015 centimeter, and it would take about 7000 carbon atoms to span the diameter of the strand. To put this in perspective, if a carbon atom were the size of a dime, the cross-section of one strand would be larger than a football field, which would require about 150 million carbon atom "dimes" to cover it. (Figure **1.2.5**) shows increasingly close microscopic and atomic-level views of ordinary cotton.



Figure **1.2.5**: These images provide an increasingly closer view: (a) a cotton boll, (b) a single cotton fiber viewed under an optical microscope (magnified 40 times), (c) an image of a cotton fiber obtained with an electron microscope (much higher magnification than with the optical microscope); and (d and e) atomic-level models of the fiber (spheres of different colors represent atoms of different elements). (credit c: modification of work by "Featheredtar"/Wikimedia Commons)

Figure A shows a puffy white cotton boll growing on a brown twig. Figure B shows a magnified cotton strand. The strand appears transparent but contains dark areas within its interior. Figure C shows the surface of several crisscrossing and overlapping cotton fibers. Its surface is rough along the edges but smooth near the center of each strand. Figure D shows three strands of molecules connected into three vertical chains. Each strand contains about five molecules. Figure E shows that the cotton molecule contains about a dozen atoms. The black carbon atoms form rings that are connected by red oxygen atoms. Many of the carbon atoms are also bonded to hydrogen atoms, shown as white balls, or other oxygen atoms.

An atom is so light that its mass is also difficult to imagine. A billion lead atoms (1,000,000,000 atoms) weigh about $\mathbf{3 \times 10^{-13}}$ grams, a mass that is far too light to be weighed on even the world's most sensitive balances. It would require over 300,000,000,000,000 lead atoms (300 trillion, or 3×10^{14}) to be weighed, and they would weigh only 0.0000001 gram.

It is rare to find collections of individual atoms. Only a few elements, such as the gases helium, neon, and argon, consist of a collection of individual atoms that move about independently of one another. Other elements, such as the gases hydrogen, nitrogen, oxygen, and chlorine, are composed of units that consist of pairs of atoms (Figure **1.2.6**). One form of the element phosphorus consists of units composed of four phosphorus atoms. The element sulfur exists in various forms, one of which consists of units composed of eight sulfur atoms. These units are called molecules. A molecule consists of two or more atoms joined by strong forces called chemical bonds. The atoms in a molecule move around as a unit, much like the cans of soda in a six-pack or a bunch of keys joined together on a single key ring. A molecule may consist of two or more identical atoms, as in the molecules found in the elements hydrogen, oxygen, and sulfur, or it may consist of two or more different atoms, as in the molecules found in water. Each water molecule is a unit that contains two hydrogen atoms and one oxygen atom. Each glucose molecule is a unit that contains 6 carbon atoms, 12 hydrogen atoms, and 6 oxygen atoms. Like atoms, molecules are incredibly small and light. If an ordinary glass of water were enlarged to the size of the earth, the water molecules inside it would be about the size of golf balls.

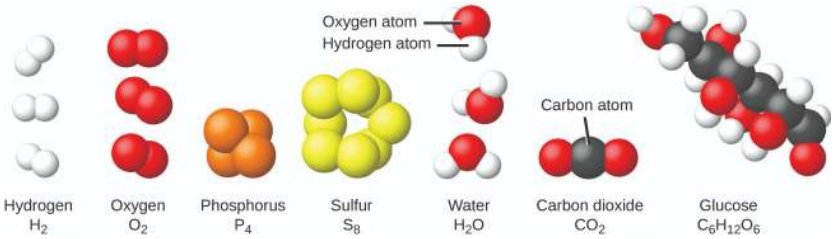

Figure **1.2.6**: The elements hydrogen, oxygen, phosphorus, and sulfur form molecules consisting of two or more atoms of the same element. The compounds water, carbon dioxide, and glucose consist of combinations of atoms of different elements.

The hydrogen molecule, H subscript 2, is shown as two small, white balls bonded together. The oxygen molecule O subscript 2, is shown as two red balls bonded together. The phosphorous molecule, P subscript 4, is shown as four orange balls bonded tightly together. The sulfur molecule, S subscript 8, is shown as 8 yellow balls linked together. Water molecules, H subscript 2 O, consist of one red oxygen atom bonded to two smaller white hydrogen atoms. The hydrogen atoms are at an angle on the oxygen molecule. Carbon dioxide, C O subscript 2, consists of one carbon atom and two oxygen atoms. One oxygen atom is bonded to the carbon's right side and the other oxygen is bonded to the carbon's left side. Glucose, C subscript 6 H subscript 12 O subscript 6, contains a chain of carbon atoms that have attached oxygen or hydrogen atoms.

Classifying Matter

We can classify matter into several categories. Two broad categories are mixtures and pure substances. A pure substance has a constant composition. All specimens of a pure substance have exactly the same makeup and properties. Any sample of sucrose (table sugar) consists of 42.1% carbon, 6.5% hydrogen, and 51.4% oxygen by mass. Any sample of sucrose also has the same physical properties, such as melting point, color, and sweetness, regardless of the source from which it is isolated.

We can divide pure substances into two classes: elements and compounds. Pure substances that cannot be broken down into simpler substances by chemical changes are called elements. Iron, silver, gold, aluminum, sulfur, oxygen, and copper are familiar examples of the more than 100 known elements, of which about 90 occur naturally on the earth, and two dozen or so have been created in laboratories.

Pure substances that can be broken down by chemical changes are called compounds. This breakdown may produce either elements or other compounds, or both. Mercury(II) oxide, an orange, crystalline solid, can be broken down by heat into the elements mercury and oxygen (Figure **1.2.7**). When heated in the absence of air, the compound sucrose is broken down into the element carbon and the compound water. (The initial stage of this process, when the sugar is turning brown, is known as caramelization—this is what imparts the characteristic sweet and nutty flavor to caramel apples, caramelized onions, and caramel). Silver(I) chloride is a white solid that can be broken down into its elements, silver and chlorine, by absorption of light. This property is the basis for the use of this compound in photographic films and photochromic eyeglasses (those with lenses that darken when exposed to light).



Figure **1.2.7**: (a)The compound mercury(II) oxide, (b)when heated, (c) decomposes into silvery droplets of liquid mercury and invisible oxygen gas. (credit: modification of work by Paul Flowers)

This figure shows a series of three photos labeled a, b, and c. Photo a shows the bottom of a test tube that is filled with an orange-red substance. A slight amount of a silver substance is also visible. Photo b shows the substance in the test tube being heated over a flame. Photo c shows a test tube that is not longer being heated. The orange-red substance is almost completely gone, and small, silver droplets of a substance are left.

The properties of combined elements are different from those in the free, or uncombined, state. For example, white crystalline sugar (sucrose) is a compound resulting from the chemical combination of the element carbon, which is a black solid in one of its uncombined forms, and the two elements hydrogen and oxygen, which are colorless gases when uncombined. Free sodium, an element that is a soft, shiny, metallic solid, and free chlorine, an element that is a yellow-green gas, combine to form sodium chloride (table salt), a compound that is a white, crystalline solid.

A mixture is composed of two or more types of matter that can be present in varying amounts and can be separated by physical changes, such as evaporation (you will learn more about this later). A mixture with a composition that varies from point to point is called a heterogeneous mixture. Italian dressing is an example of a heterogeneous mixture (Figure **1.2.1*a***). Its composition can vary because we can make it from varying amounts of oil, vinegar, and herbs. It is not the same from point to point throughout the mixture—one drop may be mostly vinegar, whereas a different drop may be mostly oil or herbs because the oil and vinegar separate and the herbs settle. Other examples of heterogeneous mixtures are chocolate chip cookies (we can see the separate bits of chocolate, nuts, and cookie dough) and granite (we can see the quartz, mica, feldspar, and more).

A homogeneous mixture, also called a solution, exhibits a uniform composition and appears visually the same throughout. An example of a solution is a sports drink, consisting of water, sugar, coloring, flavoring, and electrolytes mixed together uniformly (Figure **1.2.1*b***). Each drop of a sports drink tastes the same because each drop contains the same amounts of water, sugar, and other components. Note that the composition of a sports drink can vary—it could be made with somewhat more or less sugar, flavoring, or other components, and still be a sports drink. Other examples of homogeneous mixtures include air, maple syrup, gasoline, and a solution of salt in water.

Figure **1.2.7**: (a) Oil and vinegar salad dressing is a heterogeneous mixture because its composition is not uniform throughout. (b) A commercial sports drink is a homogeneous mixture because its composition is uniform throughout. (credit a “left”: modification of work by John Mayer; credit a “right”: modification of work by Umberto Salvagnin; credit b “left: modification of work by Jeff Bedford)

Diagram A shows a glass containing a red liquid with a layer of yellow oil floating on the surface of the red liquid. A zoom in box is magnifying a portion of the red liquid that contains some of the yellow oil. The zoomed in image shows that oil is forming round droplets within the red liquid. Diagram B shows a photo of Gatorade G 2. A zoom in box is magnifying a portion of the Gatorade, which is uniformly red.

Although there are just over 100 elements, tens of millions of chemical compounds result from different combinations of these elements. Each compound has a specific composition and possesses definite chemical and physical properties by which we can distinguish it from all other compounds. And, of course, there are innumerable ways to combine elements and compounds to form different mixtures. A summary of how to distinguish between the various major classifications of matter is shown in (Figure 1.2.8).

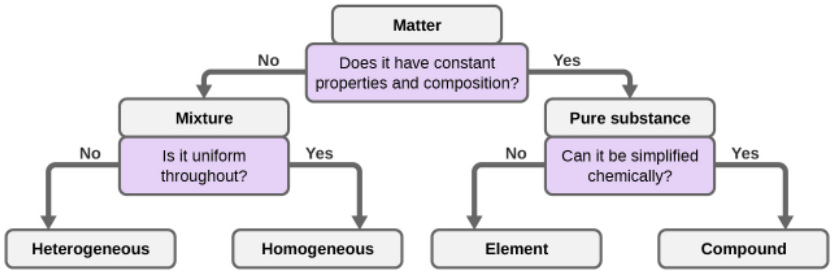

Figure **1.2.8**: Depending on its properties, a given substance can be classified as a homogeneous mixture, a heterogeneous mixture, a compound, or an element.

This flow chart begins with matter at the top and the question: does the matter have constant properties and composition? If no, then it is a mixture. This leads to the next question: is it uniform throughout? If no, it is heterogeneous. If yes, it is homogenous. If the matter does have constant properties and composition, it is a pure substance. This leads to the next question: can it be simplified chemically? If no, it is an element. If yes, then it is a compound.

Eleven elements make up about 99% of the earth’s crust and atmosphere (Table **1.2.1**). Oxygen constitutes nearly one-half and silicon about one-quarter of the total quantity of these elements. A majority of elements on earth are found in chemical combinations with other elements; about one-quarter of the elements are also found in the free state.

Table **1.2.1**: Elemental Composition of Earth

Element	Symbol	Percent Mass		Element	Symbol	Percent Mass
oxygen	O	49.20		chlorine	Cl	0.19
silicon	Si	25.67		phosphorus	P	0.11
aluminum	Al	7.50		manganese	Mn	0.09
iron	Fe	4.71		carbon	C	0.08
calcium	Ca	3.39		sulfur	S	0.06
sodium	Na	2.63		barium	Ba	0.04
potassium	K	2.40		nitrogen	N	0.03
magnesium	Mg	1.93		fluorine	F	0.03
hydrogen	H	0.87		strontium	Sr	0.02
titanium	Ti	0.58		all others	-	0.47

Decomposition of Water / Production of Hydrogen

Water consists of the elements hydrogen and oxygen combined in a 2 to 1 ratio. Water can be broken down into hydrogen and oxygen gases by the addition of energy. One way to do this is with a battery or power supply, as shown in (Figure **1.2.9**).

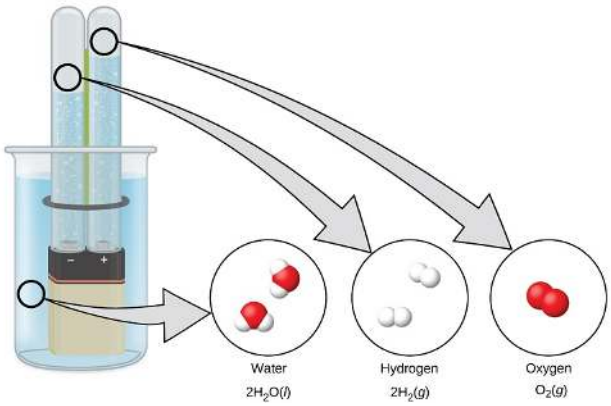

Figure **1.2.9**: The decomposition of water is shown at the macroscopic, microscopic, and symbolic levels. The battery provides an electric current (microscopic) that decomposes water. At the macroscopic level, the liquid separates into the gases hydrogen (on the left) and oxygen (on the right). Symbolically, this change is presented by showing how liquid H_2O separates into H_2 and O_2 gases.

A rectangular battery is immersed in a beaker filled with liquid. Each of the battery terminals are covered by an overturned test tube. The test tubes each contain a bubbling liquid. Zoom in areas indicate that the liquid in the beaker is water, 2 H subscript 2 O liquid. The bubbles in the test tube over the negative terminal are hydrogen gas, 2 H subscript 2 gas. The bubbles in the test tube over the positive terminal are oxygen gas, O subscript 2 gas.

The breakdown of water involves a rearrangement of the atoms in water molecules into different molecules, each composed of two hydrogen atoms and two oxygen atoms, respectively. Two water molecules form one oxygen molecule and two hydrogen molecules. The representation for what occurs, $\mathbf{2\,H_2O}(l) \rightarrow \mathbf{2\,H_2}(g) + \mathbf{O_2}(g)$, will be explored in more depth in later chapters.

The two gases produced have distinctly different properties. Oxygen is not flammable but is required for combustion of a fuel, and hydrogen is highly flammable and a potent energy source. How might this knowledge be applied in our world? One application involves research into more fuel-efficient transportation. Fuel-cell vehicles (FCV) run on hydrogen instead of gasoline (Figure **1.2.10**). They are more efficient than vehicles with internal combustion engines, are nonpolluting, and reduce greenhouse gas emissions, making us less dependent on fossil fuels. FCVs are not yet economically viable, however, and current hydrogen production depends on natural gas. If we can develop a process to economically decompose water, or produce hydrogen in another environmentally sound way, FCVs may be the way of the future.

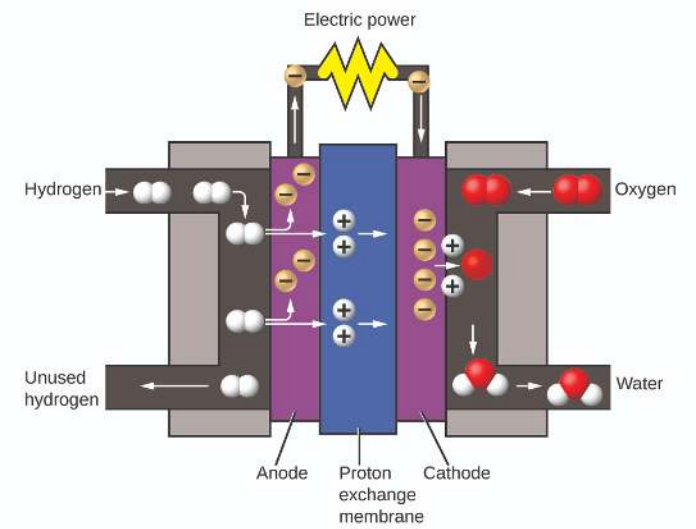

Figure **1.2.10**: A fuel cell generates electrical energy from hydrogen and oxygen via an electrochemical process and produces only water as the waste product.

The fuel cell consists of a proton exchange membrane sandwiched between an anode and a cathode. Hydrogen gas enters the battery near the anode. Oxygen gas enters the battery near the cathode. The entering hydrogen gas is broken up into single white spheres that each have a positive charge. These are protons. The protons repel negatively-charged electrons within the anode. These electrons travel through a circuit, providing electricity to anything attached to the battery. The protons continue through the proton exchange membrane and through the cathode to reach the oxygen gas molecules at the opposite end of the battery. There, the oxygen atoms split up into single red spheres. Each oxygen atom takes on two of the incoming protons to form a water molecule.

Chemistry of Cell Phones

Imagine how different your life would be without cell phones (Figure **1.2.11**) and other smart devices. Cell phones are made from numerous chemical substances, which are extracted, refined, purified, and assembled using an extensive and in-depth understanding of chemical principles. About 30% of the elements that are found in nature are found within a typical smart phone. The case/body/frame consists of a combination of sturdy, durable polymers comprised primarily of carbon, hydrogen, oxygen, and nitrogen [acrylonitrile butadiene styrene (ABS) and polycarbonate thermoplastics], and light, strong, structural metals, such as aluminum, magnesium, and iron. The display screen is made from a specially toughened glass (silica glass strengthened by the addition of aluminum, sodium, and potassium) and coated with a material to make it conductive (such as indium tin oxide). The circuit board uses a semiconductor material (usually silicon); commonly used metals like copper, tin, silver, and gold; and more unfamiliar elements such as yttrium, praseodymium, and gadolinium. The battery relies upon lithium ions and a variety of other materials, including iron, cobalt, copper, polyethylene oxide, and polyacrylonitrile.

Figure **1.2.11**: Almost one-third of naturally occurring elements are used to make a modern cell phone. (credit: modification of work by John Taylor)

A cell phone is labeled to show what its components are made of. The case components are made of polymers such as A B S and or metals such as aluminum, iron, and magnesium. The processor components are made of silicon, common metals such as copper, tin and gold, and uncommon elements such as yttrium and gadolinium. The screen components are made of silicon oxide, also known as glass. The glass is strengthened by the addition of aluminum, sodium, and potassium. The battery components contain lithium combined with other metals such as cobalt, iron, and copper.

Summary

Matter is anything that occupies space and has mass. The basic building block of matter is the atom, the smallest unit of an element that can enter into combinations with atoms of the same or other elements. In many substances, atoms are combined into molecules. On earth, matter commonly exists in three states: solids, of fixed shape and volume; liquids, of variable shape but fixed volume; and gases, of variable shape and volume. Under high-temperature conditions, matter also can exist as a plasma. Most matter is a mixture: It is composed of two or more types of matter that can be present in varying amounts and can be separated by physical means. Heterogeneous mixtures vary in composition from point to point; homogeneous mixtures have the same composition from point to point. Pure substances consist of only one type of matter. A pure substance can be an element, which consists of only one type of atom and cannot be broken down by a chemical change, or a compound, which consists of two or more types of atoms.

Glossary

atom
: smallest particle of an element that can enter into a chemical combination

compound
: pure substance that can be decomposed into two or more elements

element
: substance that is composed of a single type of atom; a substance that cannot be decomposed by a chemical change

gas
: state in which matter has neither definite volume nor shape

heterogeneous mixture
: combination of substances with a composition that varies from point to point

homogeneous mixture
: (also, solution) combination of substances with a composition that is uniform throughout

liquid
: state of matter that has a definite volume but indefinite shape

law of conservation of matter
: when matter converts from one type to another or changes form, there is no detectable change in the total amount of matter present

mass
: fundamental property indicating amount of matter

matter
: anything that occupies space and has mass

mixture
: matter that can be separated into its components by physical means

molecule
: bonded collection of two or more atoms of the same or different elements

plasma
: gaseous state of matter containing a large number of electrically charged atoms and/or molecules

pure substance

homogeneous substance that has a constant composition

solid

state of matter that is rigid, has a definite shape, and has a fairly constant volume

weight

force that gravity exerts on an object

This page titled 1.2: Phases and Classification of Matter is shared under a CC BY license and was authored, remixed, and/or curated by OpenStax.

- **1.2: Phases and Classification of Matter** by OpenStax is licensed CC BY 4.0. Original source: https://openstax.org/details/books/chemistry-2e.

1.3: Physical and Chemical Properties

Learning Objectives

- Describe the difference between physical and chemical properties or changed.
- Identify a property or transformation as either physical or chemical using symbolic, particulate, or macroscopic representations.
- Identify the properties of matter as extensive or intensive.
- Recognize and describe the parts of the NFPA hazard diamond.

The characteristics that enable us to distinguish one substance from another are called properties. A physical property is a characteristic of matter that is not associated with a change in its chemical composition. Familiar examples of physical properties include density, color, hardness, melting and boiling points, and electrical conductivity. We can observe some physical properties, such as density and color, without changing the physical state of the matter observed. Other physical properties, such as the melting temperature of iron or the freezing temperature of water, can only be observed as matter undergoes a physical change. A physical change is a change in the state or properties of matter without any accompanying change in its chemical composition (the identities of the substances contained in the matter). We observe a physical change when wax melts, when sugar dissolves in coffee, and when steam condenses into liquid water (Figure **1.3.1**). Other examples of physical changes include magnetizing and demagnetizing metals (as is done with common antitheft security tags) and grinding solids into powders (which can sometimes yield noticeable changes in color). In each of these examples, there is a change in the physical state, form, or properties of the substance, but no change in its chemical composition.

Figure **1.3.1**: (a) Wax undergoes a physical change when solid wax is heated and forms liquid wax. (b) Steam condensing inside a cooking pot is a physical change, as water vapor is changed into liquid water. (credit a: modification of work by "95jb14"/Wikimedia Commons; credit b: modification of work by "mjneuby"/Flickr).

The change of one type of matter into another type (or the inability to change) is a chemical property. Examples of chemical properties include flammability, toxicity, acidity, reactivity (many types), and heat of combustion. Iron, for example, combines with oxygen in the presence of water to form rust; chromium does not oxidize (Figure **1.3.2**). Nitroglycerin is very dangerous because it explodes easily; neon poses almost no hazard because it is very unreactive.

(a) (b)

Figure **1.3.2**: (a) One of the chemical properties of iron is that it rusts; (b) one of the chemical properties of chromium is that it does not. (credit a: modification of work by Tony Hisgett; credit b: modification of work by "Atoma"/Wikimedia Commons)

Comparison of two metal equipments. The first image shows a rusted brown appearance and the following image shows a shiny metallic appearance.

To identify a chemical property, we look for a chemical change. A chemical change always produces one or more types of matter that differ from the matter present before the change. The formation of rust is a chemical change because rust is a different kind of matter than the iron, oxygen, and water present before the rust formed. The explosion of nitroglycerin is a chemical change because the gases produced are very different kinds of matter from the original substance. Other examples of chemical changes include reactions that are performed in a lab (such as copper reacting with nitric acid), all forms of combustion (burning), and food being cooked, digested, or rotting (Figure **1.3.3**).



(a) (b)

(c) (d)

Figure **1.3.3**: (a) Copper and nitric acid undergo a chemical change to form copper nitrate and brown, gaseous nitrogen dioxide. (b) During the combustion of a match, cellulose in the match and oxygen from the air undergo a chemical change to form carbon dioxide and water vapor. (c) Cooking red meat causes a number of chemical changes, including the oxidation of iron in myoglobin that results in the familiar red-to-brown color change. (d) A banana turning brown is a chemical change as new, darker (and less tasty) substances form. (credit b: modification of work by Jeff Turner; credit c: modification of work by Gloria Cabada-Leman; credit d: modification of work by Roberto Verzo)

Four pictures. A. a flask with copper wires placed in a blue solution and also the presence of a gas. B. A lighted match. C. meat cubes being cooked on a pan. D. Bananas forming black spots on its peel.

Properties of matter fall into one of two categories. If the property depends on the amount of matter present, it is an extensive property. The mass and volume of a substance are examples of extensive properties; for instance, a gallon of milk has a larger mass and volume than a cup of milk. The value of an extensive property is directly proportional to the amount of matter in question. If the property of a sample of matter does not depend on the amount of matter present, it is an intensive property. Temperature is an example of an intensive property. If the gallon and cup of milk are each at 20 °C (room temperature), when they are combined, the temperature remains at 20 °C. As another example, consider the distinct but related properties of heat and temperature. A drop of

hot cooking oil spattered on your arm causes brief, minor discomfort, whereas a pot of hot oil yields severe burns. Both the drop and the pot of oil are at the same temperature (an intensive property), but the pot clearly contains much more heat (extensive property).

Hazard Diamond

You may have seen the symbol shown in Figure **1.3.4** on containers of chemicals in a laboratory or workplace. Sometimes called a "fire diamond" or "hazard diamond," this chemical hazard diamond provides valuable information that briefly summarizes the various dangers of which to be aware when working with a particular substance.

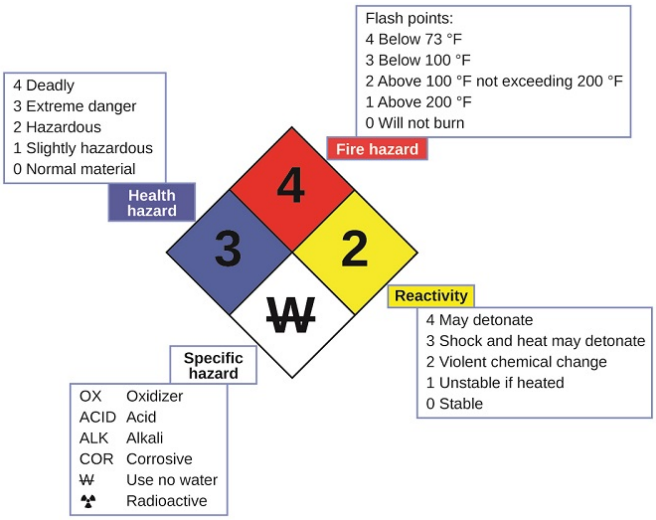

Figure **1.3.4**: The National Fire Protection Agency (NFPA) hazard diamond summarizes the major hazards of a chemical substance.

The National Fire Protection Agency (NFPA) 704 Hazard Identification System was developed by NFPA to provide safety information about certain substances. The system details flammability, reactivity, health, and other hazards. Within the overall diamond symbol, the top (red) diamond specifies the level of fire hazard (temperature range for flash point). The blue (left) diamond indicates the level of health hazard. The yellow (right) diamond describes reactivity hazards, such as how readily the substance will undergo detonation or a violent chemical change. The white (bottom) diamond points out special hazards, such as if it is an oxidizer (which allows the substance to burn in the absence of air/oxygen), undergoes an unusual or dangerous reaction with water, is corrosive, acidic, alkaline, a biological hazard, radioactive, and so on. Each hazard is rated on a scale from 0 to 4, with 0 being no hazard and 4 being extremely hazardous.

While many elements differ dramatically in their chemical and physical properties, some elements have similar properties. We can identify sets of elements that exhibit common behaviors. For example, many elements conduct heat and electricity well, whereas others are poor conductors. These properties can be used to sort the elements into three classes: metals (elements that conduct well), nonmetals (elements that conduct poorly), and metalloids (elements that have properties of both metals and nonmetals).

The periodic table is a table of elements that places elements with similar properties close together (Figure **1.3.5**). You will learn more about the periodic table as you continue your study of chemistry.

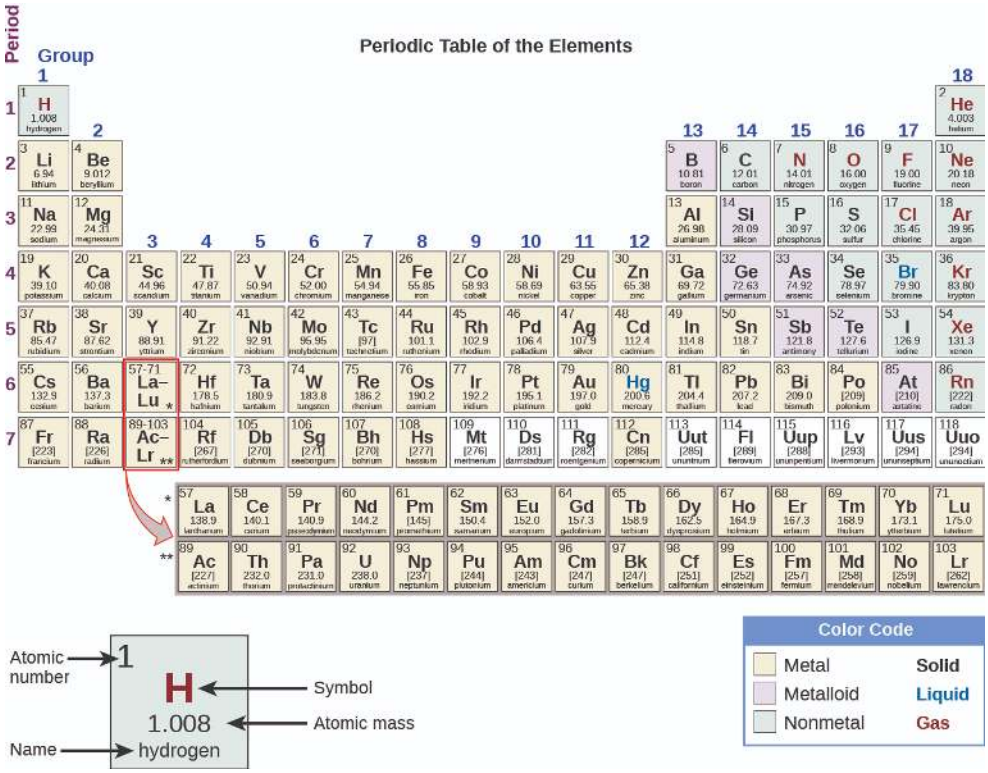

Figure **1.3.5**: The periodic table shows how elements may be grouped according to certain similar properties. Note the background color denotes whether an element is a metal, metalloid, or nonmetal, whereas the element symbol color indicates whether it is a solid, liquid, or gas.

Summary

All substances have distinct physical and chemical properties, and may undergo physical or chemical changes. Physical properties, such as hardness and boiling point, and physical changes, such as melting or freezing, do not involve a change in the composition of matter. Chemical properties, such flammability and acidity, and chemical changes, such as rusting, involve production of matter that differs from that present beforehand.

Measurable properties fall into one of two categories. Extensive properties depend on the amount of matter present, for example, the mass of gold. Intensive properties do not depend on the amount of matter present, for example, the density of gold. Heat is an example of an extensive property, and temperature is an example of an intensive property.

Glossary

chemical change
: change producing a different kind of matter from the original kind of matter

chemical property
: behavior that is related to the change of one kind of matter into another kind of matter

extensive property
: property of a substance that depends on the amount of the substance

intensive property
: property of a substance that is independent of the amount of the substance

physical change
: change in the state or properties of matter that does not involve a change in its chemical composition

physical property

characteristic of matter that is not associated with any change in its chemical composition

---

This page titled 1.3: Physical and Chemical Properties is shared under a CC BY license and was authored, remixed, and/or curated by OpenStax.

- **1.3: Physical and Chemical Properties** by OpenStax is licensed CC BY 4.0. Original source: https://openstax.org/details/books/chemistry-2e.

1.4: Measurements

Skills to Develop

- Explain the process of measurement
- Identify the three basic parts of a quantity
- Describe the properties and units of length, mass, volume, density, temperature, and time
- Perform basic unit calculations and conversions in the metric and other unit systems

Measurements provide the macroscopic information that is the basis of most of the hypotheses, theories, and laws that describe the behavior of matter and energy in both the macroscopic and microscopic domains of chemistry. **Every measurement provides three kinds of information: the size or magnitude of the measurement (a number); a standard of comparison for the measurement (a unit); and an indication of the uncertainty of the measurement.** While the number and unit are explicitly represented when a quantity is written, the uncertainty is an aspect of the measurement result that is more implicitly represented and will be discussed later.

The number in the measurement can be represented in different ways, including decimal form and scientific notation. For example, the maximum takeoff weight of a Boeing 777-200ER airliner is 298,000 kilograms, which can also be written as 2.98×10^5 kg. The mass of the average mosquito is about 0.0000025 kilograms, which can be written as 2.5×10^{-6} kg.

Units, such as liters, pounds, and centimeters, are standards of comparison for measurements. When we buy a 2-liter bottle of a soft drink, we expect that the volume of the drink was measured, so it is two times larger than the volume that everyone agrees to be 1 liter. The meat used to prepare a 0.25-pound hamburger is measured so it weighs one-fourth as much as 1 pound. Without units, a number can be meaningless, confusing, or possibly life threatening. Suppose a doctor prescribes phenobarbital to control a patient's seizures and states a dosage of "100" without specifying units. Not only will this be confusing to the medical professional giving the dose, but the consequences can be dire: 100 mg given three times per day can be effective as an anticonvulsant, but a single dose of 100 g is more than 10 times the lethal amount.

We usually report the results of scientific measurements in SI units, an updated version of the metric system, using the units listed in Table **1.4.1**. Other units can be derived from these base units. The standards for these units are fixed by international agreement, and they are called the International System of Units or SI Units (from the French, *Le Système International d'Unités*). SI units have been used by the United States National Institute of Standards and Technology (NIST) since 1964.

Table* 1.4.1*: *Example Base Units of the SI System*

Property Measured	Name of Unit	Symbol of Unit
length	meter	m
mass	kilogram	kg
time	second	s
temperature	kelvin	K
amount of substance	mole	mol

Sometimes we use units that are fractions or multiples of a base unit. Ice cream is sold in quarts (a familiar, non-SI base unit), pints (0.5 quart), or gallons (4 quarts). We also use fractions or multiples of units in the SI system, but these fractions or multiples are always powers of 10. Fractional or multiple SI units are named using a prefix and the name of the base unit. For example, a length of 1000 meters is also called a kilometer because the prefix *kilo* means "one thousand," which in scientific notation is 10^3 (1 kilometer = 1000 m = 10^3 m). The prefixes used and the powers to which 10 are raised are listed in Table **1.4.2**.

Table* 1.4.2*: *Common Unit Prefixes*

Prefix	Symbol	Going from prefix to base units		Going from base units to prefix	
		Factor	Example	Factor	Example
femto	f	10^{-15}	1 femtosecond (fs) = 1×10^{-15} s (0.000000000000001 s)	10^{15}	3 meters (m) = 3×10^{15} fm (3,000,000,000,000,000 fm)
pico	p	10^{-12}	1 picometer (pm) = 1×10^{-12} m (0.000000000001 m)	10^{12}	6 grams (g) = 6×10^{12} pg (6,000,000,000,000 pg)
nano	n	10^{-9}	4 nanograms (ng) = 4×10^{-9} g (0.000000004 g)	10^{9}	2 Liters (L) = 2×10^{9} nL (2,000,000,000 nL)
micro	**μ**	$\mathbf{10^{-6}}$	**1 microliter (μL) = 1×10^{-6} L (0.000001 L)**	$\mathbf{10^{6}}$	**1.2 seconds (s) = 1.2×10^{6} μs (1,200,000 μs)**
milli	**m**	$\mathbf{10^{-3}}$	**1 milligram (mg) = 1×10^{-3} g (0.001 g)**	$\mathbf{10^{3}}$	**5 years (yr) = 5×10^{3} myr (5,000 myr)**
centi	**c**	$\mathbf{10^{-2}}$	**7 centimete**	$\mathbf{10^{2}}$	**1 meter (m) =**

Prefix	Symbol	Going from prefix to base units		Going from base units to prefix	
		Factor	Example	Factor	Example
			rs (cm) = 7×10^{-2} m (0.07 m)		**1×10^{2} cm (100 cm)**
deci	d	10^{-1}	1 deciliter (dL) = 1×10^{-1} L (0.1 L)	10^{1}	1 gram (g) = 1×10^{1} cm (10 g)
Base Unit (i.e. meter, liter, second, year, moles, grams etc.)					
kilo	**k**	**10^{3}**	**1 kilometer (km) = 1×10^{3} m (1000 m)**	**10^{-3}**	**1 second (s) = 1×10^{-3} ks (0.001 L)**
mega	M	10^{6}	3 megaliter (ML) = 3×10^{6} Hz (3,000,000 L)	10^{-6}	9 liter (L) = 9×10^{-6} ML (0.000009 L)
giga	G	10^{9}	8 gigayears (Gyr) = 8×10^{9} yr (8,000,000,000 Gyr)	10^{-9}	4.1 grams (ng) = 4.1×10^{-9} Gg (0.000000041 g)
tera	T	10^{12}	5 teraliters (TL) = 5×10^{12} W (5,000,000,000,000	10^{-12}	1 meter (m) = 1×10^{-12} Tm (0.000000000001 m)

Prefix	Symbol	Going from prefix to base units		Going from base units to prefix	
		Factor	Example	Factor	Example
			L)		

SI Base Units

The initial units of the metric system, which eventually evolved into the SI system, were established in France during the French Revolution. The original standards for the meter and the kilogram were adopted there in 1799 and eventually by other countries. This section introduces four of the SI base units commonly used in chemistry. Other SI units will be introduced in subsequent chapters.

Length

The standard unit of length in both the SI and original metric systems is the meter (m). A meter was originally specified as 1/10,000,000 of the distance from the North Pole to the equator. It is now defined as the distance light in a vacuum travels in 1/299,792,458 of a second. A meter is about 3 inches longer than a yard (Figure **1.4.1**); one meter is about 39.37 inches or 1.094 yards. Longer distances are often reported in kilometers (1 km = 1000 m = 10^3 m), whereas shorter distances can be reported in centimeters (1 cm = 0.01 m = 10^{-2} m) or millimeters (1 mm = 0.001 m = 10^{-3} m).

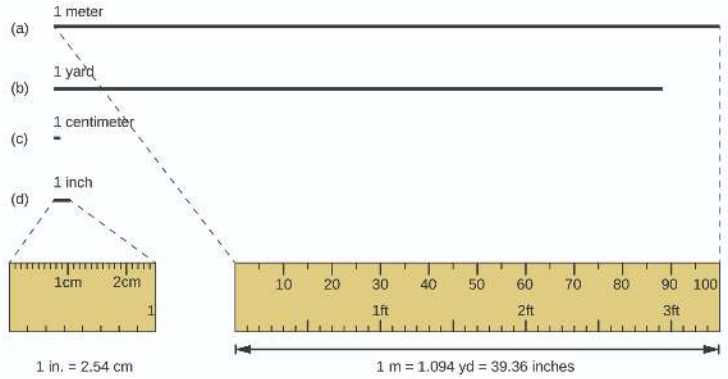

Figure **1.4.1**: The relative lengths of 1 m, 1 yd, 1 cm, and 1 in. are shown (not actual size), as well as comparisons of 2.54 cm and 1 in., and of 1 m and 1.094 yd.

Mass

The standard unit of mass in the SI system is the kilogram (kg). A kilogram was originally defined as the mass of a liter of water (a cube of water with an edge length of exactly 0.1 meter). It is now defined by a certain cylinder of platinum-iridium alloy, which is kept in France (Figure 1.4.2). Any object with the same mass as this cylinder is said to have a mass of 1 kilogram. One kilogram is about 2.2 pounds. The gram (g) is exactly equal to 1/1000 of the mass of the kilogram (10^{-3} kg).

Figure **1.4.2**: This replica prototype kilogram is housed at the National Institute of Standards and Technology (NIST) in Maryland. (credit: National Institutes of Standards and Technology).

Temperature

Temperature is an intensive property. The SI unit of temperature is the kelvin (K). The IUPAC convention is to use kelvin (all lowercase) for the word, K (uppercase) for the unit symbol, and neither the word “degree” nor the degree symbol (°). The degree Celsius (°C) is also allowed in the SI system, with both the word “degree” and the degree symbol used for Celsius measurements. Celsius degrees are the same magnitude as those of kelvin, but the two scales place their zeros in different places. Water freezes at 273.15 K (0 °C) and boils at 373.15 K (100 °C) by definition, and normal human body temperature is approximately 310 K (37 °C). The conversion between these two units and the Fahrenheit scale will be discussed later in this chapter.

Time

The SI base unit of time is the second (s). Small and large time intervals can be expressed with the appropriate prefixes; for example, 3 microseconds = 0.000003 s = 3×10^{-6} and 5 megaseconds = 5,000,000 s = 5×10^{6} s. Alternatively, hours, days, and years can be used.

Derived SI Units

We can derive many units from the seven SI base units. For example, we can use the base unit of length to define a unit of volume, and the base units of mass and length to define a unit of density.

Volume

Volume is the measure of the amount of space occupied by an object. The standard SI unit of volume is defined by the base unit of length (Figure **1.4.3**). The standard volume is a cubic meter (m^3), a cube with an edge length of exactly one meter. To dispense a cubic meter of water, we could build a cubic box with edge lengths of exactly one meter. This box would hold a cubic meter of water or any other substance.

A more commonly used unit of volume is derived from the decimeter (0.1 m, or 10 cm). A cube with edge lengths of exactly one decimeter contains a volume of one cubic decimeter (dm^3). A liter (L) is the more common name for the cubic decimeter. One liter is about 1.06 quarts. A cubic centimeter (cm^3) is the volume of a cube with an edge length of exactly one centimeter. The abbreviation **cc** (for **c**ubic **c**entimeter) is often used by health professionals. A cubic centimeter is also called a milliliter (mL) and is 1/1000 of a liter.

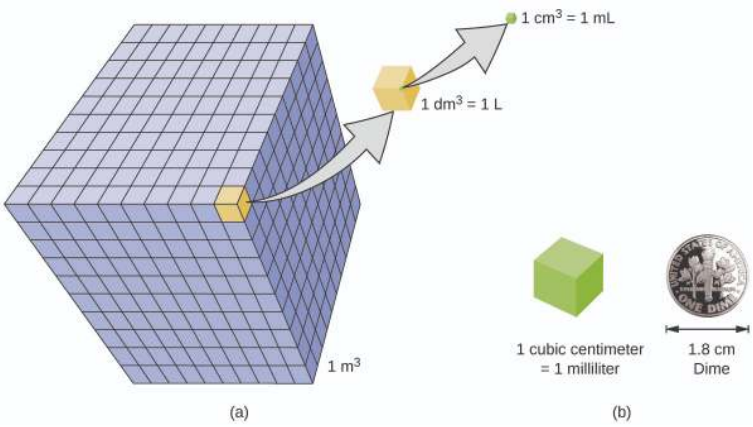

Figure **1.4.3**: (a) The relative volumes are shown for cubes of 1 m^3, 1 dm^3 (1 L), and 1 cm^3 (1 mL) (not to scale). (b) The diameter of a dime is compared relative to the edge length of a 1-cm^3 (1-mL) cube.

Density

We use the mass and volume of a substance to determine its density. Thus, the units of density are defined by the base units of mass and length.

The density of a substance is the ratio of the mass of a sample of the substance to its volume. The SI unit for density is the kilogram per cubic meter (kg/m^3). For many situations, however, this as an inconvenient unit, and we often use grams per cubic centimeter (g/cm^3) for the densities of solids and liquids, and grams per liter (g/L) for gases. Although there are exceptions, most liquids and solids have densities that range from about 0.7 g/cm^3 (the density of gasoline) to 19 g/cm^3 (the density of gold). The density of air is about 1.2 g/L. Table **1.4.3** shows the densities of some common substances.

***Table* 1.4.3:** *Densities of Common Substances*

Solids	Liquids	Gases (at 25 °C and 1 atm)
ice (at 0 °C) 0.92 g/cm^3	water 1.0 g/cm^3	dry air 1.20 g/L
oak (wood) 0.60–0.90 g/cm^3	ethanol 0.79 g/cm^3	oxygen 1.31 g/L
iron 7.9 g/cm^3	acetone 0.79 g/cm^3	nitrogen 1.14 g/L
copper 9.0 g/cm^3	glycerin 1.26 g/cm^3	carbon dioxide 1.80 g/L
lead 11.3 g/cm^3	olive oil 0.92 g/cm^3	helium 0.16 g/L
silver 10.5 g/cm^3	gasoline 0.70–0.77 g/cm^3	neon 0.83 g/L
gold 19.3 g/cm^3	mercury 13.6 g/cm^3	radon 9.1 g/L

While there are many ways to determine the density of an object, perhaps the most straightforward method involves separately finding the mass and volume of the object, and then dividing the mass of the sample by its volume. In the following example, the mass is found directly by weighing, but the volume is found indirectly through length measurements.

$$\text{density} = \frac{\text{mass}}{\text{volume}} \tag{1.4.1}$$

Example 1.4.1

Calculation of Density Gold—in bricks, bars, and coins—has been a form of currency for centuries. In order to swindle people into paying for a brick of gold without actually investing in a brick of gold, people have considered filling the centers of hollow gold bricks with lead to fool buyers into thinking that the entire brick is gold. It does not work: Lead is a dense substance, but its density is not as great as that of gold, 19.3 g/cm^3. What is the density of lead if a cube of lead has an edge length of 2.00 cm and a mass of 90.7 g?

Solution

The density of a substance can be calculated by dividing its mass by its volume. The volume of a cube is calculated by cubing the edge length.

$$\text{volume of lead cube} = 2.00\ \text{cm} \times 2.00\ \text{cm} \times 2.00\ \text{cm} = 8.00\ \text{cm}^3 onumber \tag{1.4.2}$$

$$\text{density} = \frac{\text{mass}}{\text{volume}} = \frac{90.7\ \text{g}}{8.00\ \text{cm}^3} = \frac{11.3\ \text{g}}{1.00\ \text{cm}^3} = 11.3\ \text{g/cm}^3 onumber \tag{1.4.3}$$

(We will discuss the reason for rounding to the first decimal place in the next section.)

Exercise 1.4.1

a. To three decimal places, what is the volume of a cube (cm^3) with an edge length of 0.843 cm?
b. If the cube in part (a) is copper and has a mass of 5.34 g, what is the density of copper to two decimal places?

Answer a

0.599 cm^3;

Answer b

8.91 g/cm^3

Example 1.4.2: Using Displacement of Water to Determine Density

This PhET simulation illustrates another way to determine density, using displacement of water. Determine the density of the red and yellow blocks.

Solution

When you open the density simulation and select Same Mass, you can choose from several 5.00-kg colored blocks that you can drop into a tank containing 100.00 L water. The yellow block floats (it is less dense than water), and the water level rises to 105.00 L. While floating, the yellow block displaces 5.00 L water, an amount equal to the weight of the block. The red block sinks (it is more dense than water, which has density = 1.00 kg/L), and the water level rises to 101.25 L.

The red block therefore displaces 1.25 L water, an amount equal to the volume of the block. The density of the red block is:

$$\text{density} = \frac{\text{mass}}{\text{volume}} = \frac{5.00\ \text{kg}}{1.25\ \text{L}} = 4.00\ \text{kg/L} \tag{1.4.4}$$

Note that since the yellow block is not completely submerged, you cannot determine its density from this information. But if you hold the yellow block on the bottom of the tank, the water level rises to 110.00 L, which means that it now displaces 10.00 L water, and its density can be found:

$$\text{density} = \frac{\text{mass}}{\text{volume}} = \frac{5.00\ \text{kg}}{10.00\ \text{L}} = 0.500\ \text{kg/L} \tag{1.4.5}$$

Exercise 1.4.1

Remove all of the blocks from the water and add the green block to the tank of water, placing it approximately in the middle of the tank. Determine the density of the green block.

Answer

2.00 kg/L

Summary

Measurements provide quantitative information that is critical in studying and practicing chemistry. Each measurement has an amount, a unit for comparison, and an uncertainty. Measurements can be represented in either decimal or scientific notation. Scientists primarily use the SI (International System) or metric systems. We use base SI units such as meters, seconds, and

kilograms, as well as derived units, such as liters (for volume) and g/cm^3 (for density). In many cases, we find it convenient to use unit prefixes that yield fractional and multiple units, such as microseconds (10^{-6} seconds) and megahertz (10^6 hertz), respectively.

Key Equations

- $\text{density} = \frac{\text{mass}}{\text{volume}}$

Glossary

Celsius (°C)
unit of temperature; water freezes at 0 °C and boils at 100 °C on this scale

cubic centimeter (cm^3 or cc)
volume of a cube with an edge length of exactly 1 cm

cubic meter (m^3)
SI unit of volume

density
ratio of mass to volume for a substance or object

kelvin (K)
SI unit of temperature; 273.15 K = 0 ºC

kilogram (kg)
standard SI unit of mass; 1 kg = approximately 2.2 pounds

length
measure of one dimension of an object

liter (L)
(also, cubic decimeter) unit of volume; 1 L = 1,000 cm^3

meter (m)
standard metric and SI unit of length; 1 m = approximately 1.094 yards

milliliter (mL)
1/1,000 of a liter; equal to 1 cm^3

second (s)
SI unit of time

SI units (International System of Units)
standards fixed by international agreement in the International System of Units (*Le Système International d'Unités*)

unit
standard of comparison for measurements

volume
amount of space occupied by an object

Contributors

- Paul Flowers (University of North Carolina - Pembroke), Klaus Theopold (University of Delaware) and Richard Langley (Stephen F. Austin State University) with contributing authors. Textbook content produced by OpenStax College is licensed

under a Creative Commons Attribution License 4.0 license. Download for free at http://cnx.org/contents/85abf193-2bd...a7ac8df6@9.110).

This page titled 1.4: Measurements is shared under a CC BY license and was authored, remixed, and/or curated by OpenStax.

1.5: Measurement Uncertainty, Accuracy, and Precision

Learning Objectives

- Define accuracy and precision
- Distinguish exact and uncertain numbers
- Correctly represent uncertainty in quantities using significant figures
- Apply proper rounding rules to computed quantities

Counting is the only type of measurement that is free from uncertainty, provided the number of objects being counted does not change while the counting process is underway. The result of such a counting measurement is an example of an exact number. If we count eggs in a carton, we know *exactly* how many eggs the carton contains. The numbers of defined quantities are also exact. By definition, 1 foot is exactly 12 inches, 1 inch is exactly 2.54 centimeters, and 1 gram is exactly 0.001 kilogram. Quantities derived from measurements other than counting, however, are uncertain to varying extents due to practical limitations of the measurement process used.

Significant Figures in Measurement

The numbers of measured quantities, unlike defined or directly counted quantities, are not exact. To measure the volume of liquid in a graduated cylinder, you should make a reading at the bottom of the meniscus, the lowest point on the curved surface of the liquid.

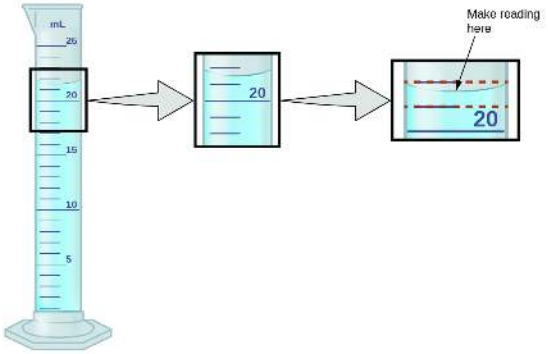

Figure 1.5.1: To measure the volume of liquid in this graduated cylinder, you must mentally subdivide the distance between the 21 and 22 mL marks into tenths of a milliliter, and then make a reading (estimate) at the bottom of the meniscus.

Refer to the illustration in Figure **1.5.1**. The bottom of the meniscus in this case clearly lies between the 21 and 22 markings, meaning the liquid volume is *certainly* greater than 21 mL but less than 22 mL. The meniscus appears to be a bit closer to the 22-mL mark than to the 21-mL mark, and so a reasonable estimate of the liquid's volume would be 21.6 mL. In the number 21.6, then, the digits 2 and 1 are certain, but the 6 is an estimate. Some people might estimate the meniscus position to be equally distant from each of the markings and estimate the tenth-place digit as 5, while others may think it to be even closer to the 22-mL mark and estimate this digit to be 7. Note that it would be pointless to attempt to estimate a digit for the hundredths place, given that the tenths-place digit is uncertain. In general, numerical scales such as the one on this graduated cylinder will permit measurements to one-tenth of the smallest scale division. The scale in this case has 1-mL divisions, and so volumes may be measured to the nearest 0.1 mL.

This concept holds true for all measurements, even if you do not actively make an estimate. If you place a quarter on a standard electronic balance, you may obtain a reading of 6.72 g. The digits 6 and 7 are certain, and the 2 indicates that the mass of the quarter is likely between 6.71 and 6.73 grams. The quarter weighs *about* 6.72 grams, with a nominal uncertainty in the measurement of ± 0.01 gram. If we weigh the quarter on a more sensitive balance, we may find that its mass is 6.723 g. This means its mass lies between 6.722 and 6.724 grams, an uncertainty of 0.001 gram. Every measurement has some uncertainty, which depends on the device used (and the user's ability). All of the digits in a measurement, including the uncertain last digit, are called significant figures or significant digits. Note that zero may be a measured value; for example, if you stand on a scale that shows weight to the nearest pound and it shows "120," then the 1 (hundreds), 2 (tens) and 0 (ones) are all significant (measured) values.

Whenever you make a measurement properly, all the digits in the result are significant. But what if you were analyzing a reported value and trying to determine what is significant and what is not? Well, for starters, all nonzero digits are significant, and it is only zeros that require some thought. We will use the terms “leading,” “trailing,” and “captive” for the zeros and will consider how to deal with them.

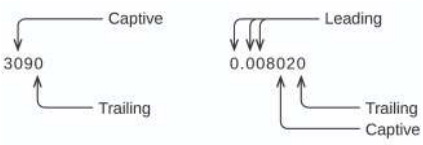

Starting with the first nonzero digit on the left, count this digit and all remaining digits to the right. This is the number of significant figures in the measurement unless the last digit is a trailing zero lying to the left of the decimal point.

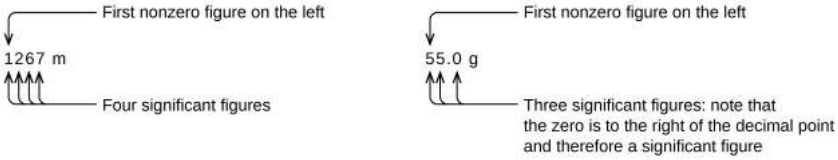

Captive zeros result from measurement and are therefore always significant. Leading zeros, however, are never significant—they merely tell us where the decimal point is located.

The leading zeros in this example are not significant. We could use exponential notation (as described in Appendix B) and express the number as 8.32407×10^{-3}; then the number 8.32407 contains all of the significant figures, and 10^{-3} locates the decimal point.

The number of significant figures is uncertain in a number that ends with a zero to the left of the decimal point location. The zeros in the measurement 1,300 grams could be significant or they could simply indicate where the decimal point is located. The ambiguity can be resolved with the use of exponential notation: 1.3×10^3 (two significant figures), 1.30×10^3 (three significant figures, if the tens place was measured), or 1.300×10^3 (four significant figures, if the ones place was also measured). In cases where only the decimal-formatted number is available, it is prudent to assume that all trailing zeros are not significant.

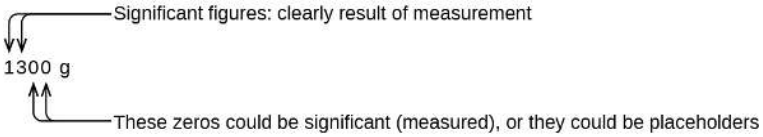

When determining significant figures, be sure to pay attention to reported values and think about the measurement and significant figures in terms of what is reasonable or likely—that is, whether the value makes sense. For example, the official January 2014 census reported the resident population of the US as 317,297,725. Do you think the US population was correctly determined to the reported nine significant figures, that is, to the exact number of people? People are constantly being born, dying, or moving into or out of the country, and assumptions are made to account for the large number of people who are not actually counted. Because of these uncertainties, it might be more reasonable to expect that we know the population to within perhaps a million or so, in which case the population should be reported as 317 million, or $\mathbf{3.17 \times 10^8}$ people.

Significant Figures in Calculations

A second important principle of uncertainty is that results calculated from a measurement are at least as uncertain as the measurement itself. We must take the uncertainty in our measurements into account to avoid misrepresenting the uncertainty in calculated results. One way to do this is to report the result of a calculation with the correct number of significant figures, which is determined by the following three rules for rounding numbers:

1. When we add or subtract numbers, we should round the result to the same number of decimal places as the number with the least number of decimal places (the least precise value in terms of addition and subtraction).
2. When we multiply or divide numbers, we should round the result to the same number of digits as the number with the least number of significant figures (the least precise value in terms of multiplication and division).
3. If the digit to be dropped (the one immediately to the right of the digit to be retained) is less than 5, we "round down" and leave the retained digit unchanged; if it is 5 or more than 5, we "round up" and increase the retained digit by 1.

The following examples illustrate the application of this rule in rounding a few different numbers to three significant figures:

- 0.028675 rounds "up" to 0.0287 (the dropped digit, 7, is greater than 5)
- 18.3384 rounds "down" to 18.3 (the dropped digit, 3, is less than 5)
- 6.8752 rounds "up" to 6.88 (the dropped digit is 5)

Let's work through these rules with a few examples.

Example 1.5.1: Rounding Numbers

Round the following to the indicated number of significant figures:

a. 31.57 (to two significant figures)
b. 8.1649 (to three significant figures)
c. 0.051065 (to four significant figures)
d. 0.90275 (to four significant figures)

Solution

a. 31.57 rounds "up" to 32 (the dropped digit is 5, and the retained digit is even)
b. 8.1649 rounds "down" to 8.16 (the dropped digit, 4, is less than 5)
c. 0.90275 rounds "up" to 0.9028 (the dropped digit is 5)

Exercise 1.5.1

Round the following to the indicated number of significant figures:

a. 0.424 (to two significant figures)
b. 0.0038661 (to three significant figures)
c. 421.25 (to four significant figures)
d. 28,683.5 (to five significant figures)

Answer a

0.42

Answer b

0.00387

Answer c

421.3

Answer d

28,684

Example 1.5.2: Addition and Subtraction with Significant Figures Rule:

When we add or subtract numbers, we should round the result to the same number of decimal places as the number with the least number of decimal places (i.e., the least precise value in terms of addition and subtraction).

a. Add 1.0023 g and 4.383 g.
b. Subtract 421.23 g from 486 g.

Solution

(a)

$$\begin{array}{r} 1.0023\ \text{g} \\ +\ 4.383\ \text{g} \\ \hline 5.3853\ \text{g} \end{array}$$

Answer is 5.385 g (round to the thousandths place; three decimal places)

(b)

$$\begin{array}{r} 486\ \text{g} \\ -\ 421.23\ \text{g} \\ \hline 64.77\ \text{g} \end{array}$$

Answer is 65 g (round to the ones place; no decimal places)

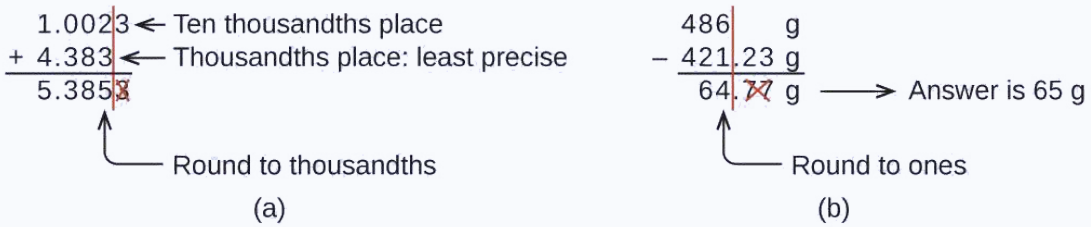

Exercise 1.5.2

a. Add 2.334 mL and 0.31 mL.
b. Subtract 55.8752 m from 56.533 m.

Answer a

2.64 mL

Answer b

0.658 m

Example 1.5.3: Multiplication and Division with Significant Figures

Rule: When we multiply or divide numbers, we should round the result to the same number of digits as the number with the least number of significant figures (the least precise value in terms of multiplication and division).

a. Multiply 0.6238 cm by 6.6 cm.
b. Divide 421.23 g by 486 mL.

Solution

(a)

$$0.6238\ \text{cm} \times 6.6\ \text{cm} = 4.11708\ \text{cm}^2 \rightarrow \text{result is } 4.1\ \text{cm}^2 \quad (1.5.1)$$
$$\text{(round to two significant figures)}$$

$$\text{four significant figures} \times \text{two significant figures} \rightarrow \text{two significant figures answer} \quad (1.5.2)$$

(b)

$$\frac{421.23\ \text{g}}{486\ \text{mL}} = 0.86728\ldots\ \text{g/mL} \rightarrow \text{result is } 0.867\ \text{g/mL} \quad (1.5.3)$$
$$\text{(round to three significant figures)}$$

$$\frac{\text{five significant figures}}{\text{three significant figures}} \rightarrow \text{three significant figures answer} \quad (1.5.4)$$

Exercise 1.5.3

a. Multiply 2.334 cm and 0.320 cm.
b. Divide 55.8752 m by 56.53 s.

Answer a

0.747 cm^2

Answer b

0.9884 m/s

In the midst of all these technicalities, it is important to keep in mind the reason why we use significant figures and rounding rules—to correctly represent the certainty of the values we report and to ensure that a calculated result is not represented as being more certain than the least certain value used in the calculation.

Example 1.5.4: Calculation with Significant Figures

One common bathtub is 13.44 dm long, 5.920 dm wide, and 2.54 dm deep. Assume that the tub is rectangular and calculate its approximate volume in liters.

Solution

$$\begin{aligned} V &= l \times w \times d \\ &= 13.44\ \text{dm} \times 5.920\ \text{dm} \times 2.54\ \text{dm} \\ &= 202.09459...\text{dm}^3\ \text{(value from calculator)} \\ &= 202\ \text{dm}^3\text{, or } 202\ \text{L (answer rounded to three significant figures)} \end{aligned}$$

Exercise 1.5.4: Determination of Density Using Water Displacement

What is the density of a liquid with a mass of 31.1415 g and a volume of 30.13 cm^3?

Answer

1.034 g/mL

Example 1.5.4

A piece of rebar is weighed and then submerged in a graduated cylinder partially filled with water, with results as shown.

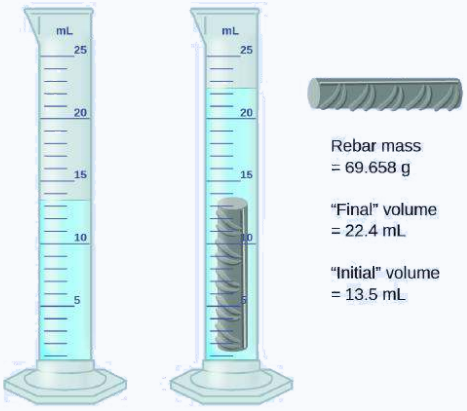

a. Use these values to determine the density of this piece of rebar.
b. Rebar is mostly iron. Does your result in (a) support this statement? How?

Solution

The volume of the piece of rebar is equal to the volume of the water displaced:

$$\text{volume} = 22.4\ \text{mL} - 13.5\ \text{mL} = 8.9\ \text{mL} = 8.9\ \text{cm}^3 onumber \tag{1.5.5}$$

(rounded to the nearest 0.1 mL, per the rule for addition and subtraction)

The density is the mass-to-volume ratio:

$$\text{density} = \frac{\text{mass}}{\text{volume}} = \frac{69.658\ \text{g}}{8.9\ \text{cm}^3} = 7.8\ \text{g/cm}^3 onumber \tag{1.5.6}$$

(rounded to two significant figures, per the rule for multiplication and division)

The density of iron is 7.9 g/cm^3, very close to that of rebar, which lends some support to the fact that rebar is mostly iron.

Exercise 1.5.4

An irregularly shaped piece of a shiny yellowish material is weighed and then submerged in a graduated cylinder, with results as shown.

a. Use these values to determine the density of this material.
b. Do you have any reasonable guesses as to the identity of this material? Explain your reasoning.

Answer a

19 g/cm^3

Answer b

It is likely gold; it has the right appearance for gold and very close to the density given for gold.

Accuracy and Precision

Scientists typically make repeated measurements of a quantity to ensure the quality of their findings and to know both the precision and the accuracy of their results. Measurements are said to be precise if they yield very similar results when repeated in the same manner. A measurement is considered accurate if it yields a result that is very close to the true or accepted value. Precise values agree with each other; accurate values agree with a true value. These characterizations can be extended to other contexts, such as the results of an archery competition (Figure 1.5.2).

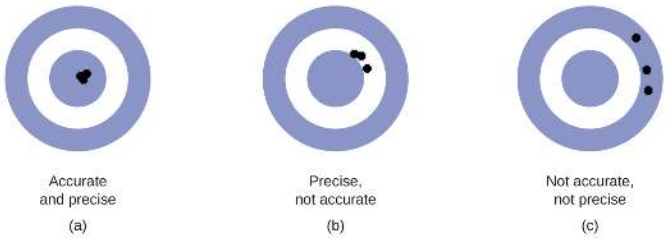

Figure 1.5.2: (a) These arrows are close to both the bull's eye and one another, so they are both accurate and precise. (b) These arrows are close to one another but not on target, so they are precise but not accurate. (c) These arrows are neither on target nor close to one another, so they are neither accurate nor precise.

Suppose a quality control chemist at a pharmaceutical company is tasked with checking the accuracy and precision of three different machines that are meant to dispense 10 ounces (296 mL) of cough syrup into storage bottles. She proceeds to use each machine to fill five bottles and then carefully determines the actual volume dispensed, obtaining the results tabulated in Table **1.5.2**.

Table **1.5.2**: Volume (mL) of Cough Medicine Delivered by 10-oz (296 mL) Dispensers

Dispenser #1	Dispenser #2	Dispenser #3
283.3	298.3	296.1
284.1	294.2	295.9
283.9	296.0	296.1
284.0	297.8	296.0
284.1	293.9	296.1

Considering these results, she will report that dispenser #1 is precise (values all close to one another, within a few tenths of a milliliter) but not accurate (none of the values are close to the target value of 296 mL, each being more than 10 mL too low). Results for dispenser #2 represent improved accuracy (each volume is less than 3 mL away from 296 mL) but worse precision (volumes vary by more than 4 mL). Finally, she can report that dispenser #3 is working well, dispensing cough syrup both accurately (all volumes within 0.1 mL of the target volume) and precisely (volumes differing from each other by no more than 0.2 mL).

Summary

Quantities can be exact or measured. Measured quantities have an associated uncertainty that is represented by the number of significant figures in the measurement. The uncertainty of a calculated value depends on the uncertainties in the values used in the calculation and is reflected in how the value is rounded. Measured values can be accurate (close to the true value) and/or precise (showing little variation when measured repeatedly).

Glossary

uncertainty
: estimate of amount by which measurement differs from true value

significant figures
: (also, significant digits) all of the measured digits in a determination, including the uncertain last digit

rounding
: procedure used to ensure that calculated results properly reflect the uncertainty in the measurements used in the calculation

precision
: how closely a measurement matches the same measurement when repeated

exact number
: number derived by counting or by definition

accuracy
: how closely a measurement aligns with a correct value

Contributors

- Paul Flowers (University of North Carolina - Pembroke), Klaus Theopold (University of Delaware) and Richard Langley (Stephen F. Austin State University) with contributing authors. Textbook content produced by OpenStax College is licensed

under a Creative Commons Attribution License 4.0 license. Download for free at http://cnx.org/contents/85abf193-2bd...a7ac8df6@9.110).

This page titled 1.5: Measurement Uncertainty, Accuracy, and Precision is shared under a CC BY license and was authored, remixed, and/or curated by OpenStax.

1.6: Mathematical Treatment of Measurement Results

Learning Objectives

- Explain the dimensional analysis (factor label) approach to mathematical calculations involving quantities.
- Describe how to use dimensional analysis to carry out unit conversions for a given property and computations involving two or more properties.
- Convert between the three main temperature units: Fahrenheit, Celsius, and Kelvin.

It is often the case that a quantity of interest may not be easy (or even possible) to measure directly but instead must be calculated from other directly measured properties and appropriate mathematical relationships. For example, consider measuring the average speed of an athlete running sprints. This is typically accomplished by measuring the *time* required for the athlete to run from the starting line to the finish line, and the *distance* between these two lines, and then computing *speed* from the equation that relates these three properties:

$$\text{speed} = \frac{\text{distance}}{\text{time}}$$

An Olympic-quality sprinter can run 100 m in approximately 10 s, corresponding to an average speed of

$$\frac{100\ \text{m}}{10\ \text{s}} = 10\ \text{m/s}$$

Note that this simple arithmetic involves dividing the numbers of each measured quantity to yield the number of the computed quantity (100/10 = 10) *and likewise* dividing the units of each measured quantity to yield the unit of the computed quantity (m/s = m/s). Now, consider using this same relation to predict the time required for a person running at this speed to travel a distance of 25 m. The same relation between the three properties is used, but in this case, the two quantities provided are a speed (10 m/s) and a distance (25 m). To yield the sought property, time, the equation must be rearranged appropriately:

$$\text{time} = \frac{\text{distance}}{\text{speed}}$$

The time can then be computed as:

$$\frac{25\ \text{m}}{10\ \text{m/s}} = 2.5\ \text{s}$$

Again, arithmetic on the numbers (25/10 = 2.5) was accompanied by the same arithmetic on the units (m/m/s = s) to yield the number and unit of the result, 2.5 s. Note that, just as for numbers, when a unit is divided by an identical unit (in this case, m/m), the result is "1"—or, as commonly phrased, the units "cancel."

These calculations are examples of a versatile mathematical approach known as dimensional analysis (or the factor-label method). Dimensional analysis is based on this premise: *the units of quantities must be subjected to the same mathematical operations as their associated numbers*. This method can be applied to computations ranging from simple unit conversions to more complex, multi-step calculations involving several different quantities.

Conversion Factors and Dimensional Analysis

A ratio of two equivalent quantities expressed with different measurement units can be used as a unit conversion factor. For example, the lengths of 2.54 cm and 1 in. are equivalent (by definition), and so a unit conversion factor may be derived from the ratio,

$$\frac{2.54\ \text{cm}}{1\ \text{in.}}\ (2.54\ \text{cm} = 1\ \text{in.})\ \text{or}\ 2.54\ \frac{\text{cm}}{\text{in.}}$$

Several other commonly used conversion factors are given in Table **1.6.1**.

Table **1.6.1**: Common Conversion Factors

Length	Volume	Mass
1 m = 1.0936 yd	1 L = 1.0567 qt	1 kg = 2.2046 lb
1 in. = 2.54 cm (exact)	1 qt = 0.94635 L	1 lb = 453.59 g
1 km = 0.62137 mi	1 ft^3 = 28.317 L	1 (avoirdupois) oz = 28.349 g
1 mi = 1609.3 m	1 tbsp = 14.787 mL	1 (troy) oz = 31.103 g

When we multiply a quantity (such as distance given in inches) by an appropriate unit conversion factor, we convert the quantity to an equivalent value with different units (such as distance in centimeters). For example, a basketball player's vertical jump of 34 inches can be converted to centimeters by:

$$34\ \cancel{\text{in.}} \times \frac{2.54\ \text{cm}}{1\ \cancel{\text{in.}}} = 86\ \text{cm}$$

Since this simple arithmetic involves *quantities*, the premise of dimensional analysis requires that we multiply both *numbers and units*. The numbers of these two quantities are multiplied to yield the number of the product quantity, 86, whereas the units are multiplied to yield

$$\frac{\text{in.} \times \text{cm}}{\text{in.}}.$$

Just as for numbers, a ratio of identical units is also numerically equal to one,

$$\frac{\text{in.}}{\text{in.}} = 1$$

and the unit product thus simplifies to *cm*. (When identical units divide to yield a factor of 1, they are said to "cancel.") Using dimensional analysis, we can determine that a unit conversion factor has been set up correctly by checking to confirm that the original unit will cancel, and the result will contain the sought (converted) unit.

Example 1.6.1: Using a Unit Conversion Factor

The mass of a competition Frisbee is 125 g. Convert its mass to ounces using the unit conversion factor derived from the relationship 1 oz = 28.349 g (Table **1.6.1**).

Solution

If we have the conversion factor, we can determine the mass in kilograms using an equation similar the one used for converting length from inches to centimeters.

$$x\ \text{oz} = 125\ \text{g} \times \text{unit conversion factor}$$

We write the unit conversion factor in its two forms:

$$\frac{1\text{ oz}}{28.349\text{ g}}\text{ and }\frac{28.349\text{ g}}{1\text{ oz}}$$

The correct unit conversion factor is the ratio that cancels the units of grams and leaves ounces.

$$\begin{aligned} x\text{ oz} &= 125\ \cancel{\text{g}} \times \frac{1\text{ oz}}{28.349\ \cancel{\text{g}}} \\ &= \left(\frac{125}{28.349}\right)\text{ oz} \\ &= 4.41\text{ oz (three significant figures)} \end{aligned}$$

? Exercise 1.6.1

Convert a volume of 9.345 qt to liters.

Answer

8.844 L

Beyond simple unit conversions, the factor-label method can be used to solve more complex problems involving computations. Regardless of the details, the basic approach is the same—all the *factors* involved in the calculation must be appropriately oriented to insure that their *labels* (units) will appropriately cancel and/or combine to yield the desired unit in the result. This is why it is referred to as the factor-label method. As your study of chemistry continues, you will encounter many opportunities to apply this approach.

✓ Example 1.6.2: Computing Quantities from Measurement Results

What is the density of common antifreeze in units of g/mL? A 4.00-qt sample of the antifreeze weighs 9.26 lb.

Solution

Since $\text{density} = \frac{\text{mass}}{\text{volume}}$, we need to divide the mass in grams by the volume in milliliters. In general: the number of units of B = the number of units of A × unit conversion factor. The necessary conversion factors are given in Table 1.7.1: 1 lb = 453.59 g; 1 L = 1.0567 qt; 1 L = 1,000 mL. We can convert mass from pounds to grams in one step:

$$9.26\ \cancel{\text{lb}} \times \frac{453.59\text{ g}}{1\ \cancel{\text{lb}}} = 4.20 \times 10^3\text{ g}$$

We need to use two steps to convert volume from quarts to milliliters.

1. *Convert quarts to liters.*

$$4.00\ \cancel{\text{qt}} \times \frac{1\text{ L}}{1.0567\ \cancel{\text{qt}}} = 3.78\text{ L}$$

2. *Convert liters to milliliters.*

$$3.78\ \cancel{\text{L}} \times \frac{1000\text{ mL}}{1\ \cancel{\text{L}}} = 3.78 \times 10^3\text{ mL}$$

Then,

$$\text{density} = \frac{4.20 \times 10^3\text{ g}}{3.78 \times 10^3\text{ mL}} = 1.11\text{ g/mL}$$

Alternatively, the calculation could be set up in a way that uses three unit conversion factors sequentially as follows:

$$\frac{9.26\ \cancel{\text{lb}}}{4.00\ \cancel{\text{qt}}} \times \frac{453.59\text{ g}}{1\ \cancel{\text{lb}}} \times \frac{1.0567\ \cancel{\text{qt}}}{1\ \cancel{\text{L}}} \times \frac{1\ \cancel{\text{L}}}{1000\text{ mL}} = 1.11\text{ g/mL}$$

? Exercise 1.6.2

What is the volume in liters of 1.000 oz, given that 1 L = 1.0567 qt and 1 qt = 32 oz (exactly)?

Answer

2.956×10^{-2} L

✓ Example 1.6.3: Computing Quantities from Measurement Results

While being driven from Philadelphia to Atlanta, a distance of about 1250 km, a 2014 Lamborghini Aventador Roadster uses 213 L gasoline.

a. What (average) fuel economy, in miles per gallon, did the Roadster get during this trip?
b. If gasoline costs $3.80 per gallon, what was the fuel cost for this trip?

Solution

(a) We first convert distance from kilometers to miles:

$$1250\text{ km} \times \frac{0.62137\text{ mi}}{1\text{ km}} = 777\text{ mi}$$

and then convert volume from liters to gallons:

$$213\ \cancel{\text{L}} \times \frac{1.0567\ \cancel{\text{qt}}}{1\ \cancel{\text{L}}} \times \frac{1\text{ gal}}{4\ \cancel{\text{qt}}} = 56.3\text{ gal}$$

Then,

$$\text{(average) mileage} = \frac{777\text{ mi}}{56.3\text{ gal}} = 13.8\text{ miles/gallon} = 13.8\text{ mpg}$$

Alternatively, the calculation could be set up in a way that uses all the conversion factors sequentially, as follows:

$$\frac{1250\ \cancel{\text{km}}}{213\ \cancel{\text{L}}} \times \frac{0.62137\text{ mi}}{1\ \cancel{\text{km}}} \times \frac{1\ \cancel{\text{L}}}{1.0567\ \cancel{\text{qt}}} \times \frac{4\ \cancel{\text{qt}}}{1\text{ gal}} = 13.8\text{ mpg}$$

(b) Using the previously calculated volume in gallons, we find:

$$56.3\ \text{gal} \times \frac{\$3.80}{1\ \text{gal}} = \$214$$

? Exercise 1.6.3

A Toyota Prius Hybrid uses 59.7 L gasoline to drive from San Francisco to Seattle, a distance of 1300 km (two significant digits).

a. What (average) fuel economy, in miles per gallon, did the Prius get during this trip?
b. If gasoline costs $3.90 per gallon, what was the fuel cost for this trip?

Answer a

51 mpg

Answer b

$62

Conversion of Temperature Units

We use the word temperature to refer to the hotness or coldness of a substance. One way we measure a change in temperature is to use the fact that most substances expand when their temperature increases and contract when their temperature decreases. The mercury or alcohol in a common glass thermometer changes its volume as the temperature changes. Because the volume of the liquid changes more than the volume of the glass, we can see the liquid expand when it gets warmer and contract when it gets cooler.

To mark a scale on a thermometer, we need a set of reference values: Two of the most commonly used are the freezing and boiling temperatures of water at a specified atmospheric pressure. On the Celsius scale, 0 °C is defined as the freezing temperature of water and 100 °C as the boiling temperature of water. The space between the two temperatures is divided into 100 equal intervals, which we call degrees. On the Fahrenheit scale, the freezing point of water is defined as 32 °F and the boiling temperature as 212 °F. The space between these two points on a Fahrenheit thermometer is divided into 180 equal parts (degrees).

Defining the Celsius and Fahrenheit temperature scales as described in the previous paragraph results in a slightly more complex relationship between temperature values on these two scales than for different units of measure for other properties. Most measurement units for a given property are directly proportional to one another (y = mx). Using familiar length units as one example:

$$\text{length in feet} = \left(\frac{1\ \text{ft}}{12\ \text{in.}}\right) \times \text{length in inches}$$

where

- y = length in feet,
- x = length in inches, and
- the proportionality constant, m, is the conversion factor.

The Celsius and Fahrenheit temperature scales, however, do not share a common zero point, and so the relationship between these two scales is a linear one rather than a proportional one ($y = mx + b$). Consequently, converting a temperature from one of these scales into the other requires more than simple multiplication by a conversion factor, m, it also must take into account differences in the scales' zero points (b).

The linear equation relating Celsius and Fahrenheit temperatures is easily derived from the two temperatures used to define each scale. Representing the Celsius temperature as x and the Fahrenheit temperature as y, the slope, m, is computed to be:

$$\begin{aligned} m &= \frac{\Delta y}{\Delta x} \\ &= \frac{212\ ^\circ\text{F} - 32\ ^\circ\text{F}}{100\ ^\circ\text{C} - 0\ ^\circ\text{C}} \\ &= \frac{180\ ^\circ\text{F}}{100\ ^\circ\text{C}} \\ &= \frac{9\ ^\circ\text{F}}{5\ ^\circ\text{C}} \end{aligned}$$

The y-intercept of the equation, *b*, is then calculated using either of the equivalent temperature pairs, (100 °C, 212 °F) or (0 °C, 32 °F), as:

$$\begin{aligned} b &= y - mx \\ &= 32\ ^\circ\text{F} - \frac{9\ ^\circ\text{F}}{5\ ^\circ\text{C}} \times 0\ ^\circ\text{C} \\ &= 32\ ^\circ\text{F} \end{aligned}$$

The equation relating the temperature scales is then:

$$T_{^\circ\text{F}} = \left(\frac{9\ ^\circ\text{F}}{5\ ^\circ\text{C}} \times T_{^\circ\text{C}}\right) + 32\ ^\circ\text{C}$$

An abbreviated form of this equation that omits the measurement units is:

$$T_{^\circ\text{F}} = \frac{9}{5} \times T_{^\circ\text{C}} + 32$$

Rearrangement of this equation yields the form useful for converting from Fahrenheit to Celsius:

$$T_{^\circ\text{C}} = \frac{5}{9}(T_{^\circ\text{F}} + 32)$$

As mentioned earlier in this chapter, the SI unit of temperature is the kelvin (K). Unlike the Celsius and Fahrenheit scales, the kelvin scale is an absolute temperature scale in which 0 (zero) K corresponds to the lowest temperature that can theoretically be achieved. The early 19th-century discovery of the relationship between a gas's volume and temperature suggested that the volume of a gas would be zero at −273.15 °C. In 1848, British physicist William Thompson, who later adopted the title of Lord Kelvin, proposed an absolute temperature scale based on this concept (further treatment of this topic is provided in this text's chapter on gases).

The freezing temperature of water on this scale is 273.15 K and its boiling temperature 373.15 K. Notice the numerical difference in these two reference temperatures is 100, the same as for the Celsius scale, and so the linear relation between these two temperature scales will exhibit a slope of $1\ \frac{\text{K}}{^\circ\text{C}}$. Following the same approach, the equations for converting between the kelvin and Celsius temperature scales are derived to be:

$$T_{\text{K}} = T_{^\circ\text{C}} + 273.15$$

$$T_{°C} = T_K - 273.15$$

The 273.15 in these equations has been determined experimentally, so it is not exact. Figure 1.6.1 shows the relationship among the three temperature scales. Recall that we do not use the degree sign with temperatures on the kelvin scale.

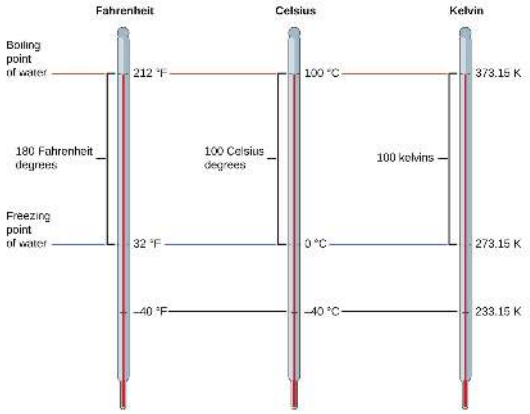

Figure 1.6.1: The Fahrenheit, Celsius, and kelvin temperature scales are compared.

Although the kelvin (absolute) temperature scale is the official SI temperature scale, Celsius is commonly used in many scientific contexts and is the scale of choice for nonscience contexts in almost all areas of the world. Very few countries (the U.S. and its territories, the Bahamas, Belize, Cayman Islands, and Palau) still use Fahrenheit for weather, medicine, and cooking.

Example 1.6.4: Conversion from Celsius

Normal body temperature has been commonly accepted as 37.0 °C (although it varies depending on time of day and method of measurement, as well as among individuals). What is this temperature on the kelvin scale and on the Fahrenheit scale?

Solution

$$\text{K} = {}^\circ\text{C} + 273.15 = 37.0 + 273.2 = 310.2\ \text{K}$$

$${}^\circ\text{F} = \frac{9}{5}\,{}^\circ\text{C} + 32.0 = \left(\frac{9}{5} \times 37.0\right) + 32.0 = 66.6 + 32.0 = 98.6\ {}^\circ\text{F}$$

Exercise 1.6.4

Convert 80.92 °C to K and °F.

Answer

354.07 K, 177.7 °F

Example 1.6.5: Conversion from Fahrenheit

Baking a ready-made pizza calls for an oven temperature of 450 °F. If you are in Europe, and your oven thermometer uses the Celsius scale, what is the setting? What is the kelvin temperature?

Solution

$${}^\circ\text{C} = \frac{5}{9}({}^\circ\text{F} - 32) = \frac{5}{9}(450 - 32) = \frac{5}{9} \times 418 = 232{}^\circ\text{C} \rightarrow \text{set oven to } 230{}^\circ\text{C}$$
(two significant figures)

$$\text{K} = {}^\circ\text{C} + 273.15 = 230 + 273 = 503\ \text{K} \rightarrow 5.0 \times 10^2\ \text{K} \quad \text{(two significant figures)}$$

Exercise 1.6.5

Convert 50 °F to °C and K.

Answer

10 °C, 280 K

Summary

Measurements are made using a variety of units. It is often useful or necessary to convert a measured quantity from one unit into another. These conversions are accomplished using unit conversion factors, which are derived by simple applications of a mathematical approach called the factor-label method or dimensional analysis. This strategy is also employed to calculate sought quantities using measured quantities and appropriate mathematical relations.

Key Equations

- $T_{°C} = \frac{5}{9} \times T_{°F} - 32$
- $T_{°F} = \frac{9}{5} \times T_{°C} + 32$
- $T_K = {}^\circ\text{C} + 273.15$
- $T_{°C} = \text{K} - 273.15$

Glossary

dimensional analysis

(also, factor-label method) versatile mathematical approach that can be applied to computations ranging from simple unit conversions to more complex, multi-step calculations involving several different quantities

Fahrenheit
unit of temperature; water freezes at 32 °F and boils at 212 °F on this scale

unit conversion factor
ratio of equivalent quantities expressed with different units; used to convert from one unit to a different unit

---

This page titled 1.6: Mathematical Treatment of Measurement Results is shared under a CC BY license and was authored, remixed, and/or curated by OpenStax.

- **1.6: Mathematical Treatment of Measurement Results** by OpenStax is licensed CC BY 4.0. Original source: https://openstax.org/details/books/chemistry-2e.

https://chem.libretexts.org/@go/page/162443

Appendix 1: Essential Mathematics Review

Scientific Notation

Scientific notation (also referred to as *exponential notation*) is used to express very large and very small numbers as a product of two numbers. The first number of the product, the *digit term*, is usually a number not less than 1 and not greater than 10. The second number of the product, the *exponential term*, is written as 10 with an exponent. Some examples of exponential notation are:

$$1000 = 1 \times 10^{3} \quad \text{(Appendix 1.1)}$$
$$100 = 1 \times 10^{2} \quad \text{(Appendix 1.2)}$$
$$10 = 1 \times 10^{1} \quad \text{(Appendix 1.3)}$$
$$1 = 1 \times 10^{0} \quad \text{(Appendix 1.4)}$$
$$0.1 = 1 \times 10^{-1} \quad \text{(Appendix 1.5)}$$
$$0.001 = 1 \times 10^{-3} \quad \text{(Appendix 1.6)}$$
$$2386 = 2.386 \times 1000 = 2.386 \times 10^{3} \quad \text{(Appendix 1.7)}$$
$$0.123 = 1.23 \times 0.1 = 1.23 \times 10^{-1} \quad \text{(Appendix 1.8)}$$

The power (exponent) of 10 is equal to the number of places the decimal is shifted to give the digit number. The exponential method is particularly useful notation for every large and very small numbers. For example, 1,230,000,000 = 1.23×10^{9}, and $0.00000000036 \times 10^{-10}$.

Addition of Exponentials

Convert all numbers to the same power of 10, add the digit terms of the numbers, and if appropriate, convert the digit term back to a number between 1 and 10 by adjusting the exponential term.

Adding Exponentials Add 5.00×10^{-5} and 3.00×10^{-3}.

Solution

$$3.00 \times 10^{-3} = 300 \times 10^{-5} \quad \text{(Appendix 1.9)}$$
$$(5.00 \times 10^{-5}) + (300 \times 10^{-5}) = 305 \times 10^{-5} = 3.05 \times 10^{-3} \quad \text{(Appendix 1.10)}$$

Subtraction of Exponentials

Convert all numbers to the same power of 10, take the difference of the digit terms, and if appropriate, convert the digit term back to a number between 1 and 10 by adjusting the exponential term.

Subtracting Exponentials Subtract 4.0×10^{-7} from 5.0×10^{-6}.

Solution

$$4.0 \times 10^{-7} = 0.40 \times 10^{-6} \quad \text{(Appendix 1.11)}$$
$$(5.0 \times 10^{-6}) - (0.40 \times 10^{-6}) = 4.6 \times 10^{-6}$$

Multiplication of Exponentials

Multiply the digit terms in the usual way and add the exponents of the exponential terms.

Multiplying Exponentials Multiply 4.2×10^{-8} by 2.0×10^{3}.

Solution

$$(4.2 \times 10^{-8}) \times (2.0 \times 10^{3}) = (4.2 \times 2.0) \times 10^{(-8)+(+3)} = 8.4 \times 10^{-5} \quad \text{(Appendix 1.12)}$$

Division of Exponentials

Divide the digit term of the numerator by the digit term of the denominator and subtract the exponents of the exponential terms.

Dividing Exponentials Divide 3.6×10^{-5} by 6.0×10^{-4}.

Solution

$$\frac{3.6 \times 10^{-5}}{6.0 \times 10^{-4}} = \left(\frac{3.6}{6.0}\right) \times 10^{(-5)-(-4)} = 0.60 \times 10^{-1} = 6.0 \times 10^{-2} \quad \text{(Appendix 1.13)}$$

Squaring of Exponentials

Square the digit term in the usual way and multiply the exponent of the exponential term by 2.

Squaring Exponentials Square the number 4.0×10^{-6}.

Solution

$$(4.0 \times 10^{-6})^2 = 4 \times 4 \times 10^{2\times(-6)} = 16 \times 10^{-12} = 1.6 \times 10^{-11} \quad \text{(Appendix 1.14)}$$

Cubing of Exponentials

Cube the digit term in the usual way and multiply the exponent of the exponential term by 3.

Cubing Exponentials Cube the number 2×10^{4}.

Solution

$$(2 \times 10^{4})^3 = 2 \times 2 \times 2 \times 10^{3\times4} = 8 \times 10^{12} \quad \text{(Appendix 1.15)}$$

Taking Square Roots of Exponentials

If necessary, decrease or increase the exponential term so that the power of 10 is evenly divisible by 2. Extract the square root of the digit term and divide the exponential term by 2.

Finding the Square Root of Exponentials Find the square root of 1.6×10^{-7}.

Solution

$$1.6 \times 10^{-7} = 16 \times 10^{-8} \quad \text{(Appendix 1.16)}$$

$$\sqrt{16 \times 10^{-8}} = \sqrt{16} \times \sqrt{10^{-8}} = \sqrt{16} \times 10^{-\frac{8}{2}} = 4.0 \times 10^{-4} \quad \text{(Appendix 1.17)}$$

Significant Figures

A beekeeper reports that he has 525,341 bees. The last three figures of the number are obviously inaccurate, for during the time the keeper was counting the bees, some of them died and others hatched; this makes it quite difficult to determine the exact number of bees. It would have been more accurate if the beekeeper had reported the number 525,000. In other words, the last three figures are not significant, except to set the position of the decimal point. Their exact values have no meaning useful in this situation. In reporting any information as numbers, use only as many significant figures as the accuracy of the measurement warrants.

The importance of significant figures lies in their application to fundamental computation. In addition and subtraction, the sum or difference should contain as many digits to the right of the decimal as that in the least certain of the numbers used in the computation (indicated by underscoring in the following example).

Addition and Subtraction with Significant Figures Add 4.383 g and 0.0023 g.

Solution

$$4.38\underline{3}\text{ g} \quad \text{(Appendix 1.18)}$$
$$0.002\underline{3}\text{ g} \quad \text{(Appendix 1.19)}$$
$$4.38\underline{5}\text{ g} \quad \text{(Appendix 1.20)}$$

In multiplication and division, the product or quotient should contain no more digits than that in the factor containing the least number of significant figures.

Multiplication and Division with Significant Figures Multiply 0.6238 by 6.6.

Solution

$$0.623\underline{8} \times 6.\underline{6} = 4.\underline{1} \quad \text{(Appendix 1.21)}$$

When rounding numbers, increase the retained digit by 1 if it is followed by a number larger than 5 ("round up"). Do not change the retained digit if the digits that follow are less than 5 ("round down"). If the retained digit is followed by 5, round up if the retained digit is odd, or round down if it is even (after rounding, the retained digit will thus always be even).

The Use of Logarithms and Exponential Numbers

The common logarithm of a number (log) is the power to which 10 must be raised to equal that number. For example, the common logarithm of 100 is 2, because 10 must be raised to the second power to equal 100. Additional examples follow.

Logarithms and Exponential Numbers		
Number	Number Expressed Exponentially	Common Logarithm
1000	10^3	3
10	10^1	1
1	10^0	0
0.1	10^{-1}	−1
0.001	10^{-3}	−3

What is the common logarithm of 60? Because 60 lies between 10 and 100, which have logarithms of 1 and 2, respectively, the logarithm of 60 is 1.7782; that is,

$$60 = 10^{1.7782} \quad \text{(Appendix 1.22)}$$

The common logarithm of a number less than 1 has a negative value. The logarithm of 0.03918 is −1.4069, or

$$0.03918 = 10^{-1.4069} = \frac{1}{10^{1.4069}} \quad \text{(Appendix 1.23)}$$

To obtain the common logarithm of a number, use the *log* button on your calculator. To calculate a number from its logarithm, take the inverse log of the logarithm, or calculate 10^x (where x is the logarithm of the number).

The natural logarithm of a number (ln) is the power to which e must be raised to equal the number; e is the constant 2.7182818. For example, the natural logarithm of 10 is 2.303; that is,

$$10 = e^{2.303} = 2.7182818^{2.303} \quad \text{(Appendix 1.24)}$$

To obtain the natural logarithm of a number, use the *ln* button on your calculator. To calculate a number from its natural logarithm, enter the natural logarithm and take the inverse ln of the natural logarithm, or calculate e^x (where x is the natural logarithm of the number).

Logarithms are exponents; thus, operations involving logarithms follow the same rules as operations involving exponents.

1. The logarithm of a product of two numbers is the sum of the logarithms of the two numbers.

$$\log xy = \log x + \log y, \text{ and } \ln xy = \ln x + \ln y \quad \text{(Appendix 1.25)}$$

2. The logarithm of the number resulting from the division of two numbers is the difference between the logarithms of the two numbers.

$$\log \frac{x}{y} = \log x - \log y, \text{ and } \ln \frac{x}{y} = \ln x - \ln y \quad \text{(Appendix 1.26)}$$

3. The logarithm of a number raised to an exponent is the product of the exponent and the logarithm of the number.

$$\log x^n = n \log x \text{ and } \ln x^n = n \ln x \quad \text{(Appendix 1.27)}$$

Two-Dimensional (*x*-*y*) Graphing

The relationship between any two properties of a system can be represented graphically by a two-dimensional data plot. Such a graph has two axes: a horizontal one corresponding to the independent variable, or the variable whose value is being controlled (*x*), and a vertical axis corresponding to the dependent variable, or the variable whose value is being observed or measured (*y*).

When the value of *y* is changing as a function of *x* (that is, different values of *x* correspond to different values of *y*), a graph of this change can be plotted or sketched. The graph can be produced by using specific values for (*x*,*y*) data pairs.

Graphing the Dependence of *y* on *x*

x	*y*
1	5
2	10
3	7
4	14

This table contains the following points: (1,5), (2,10), (3,7), and (4,14). Each of these points can be plotted on a graph and connected to produce a graphical representation of the dependence of *y* on *x*.

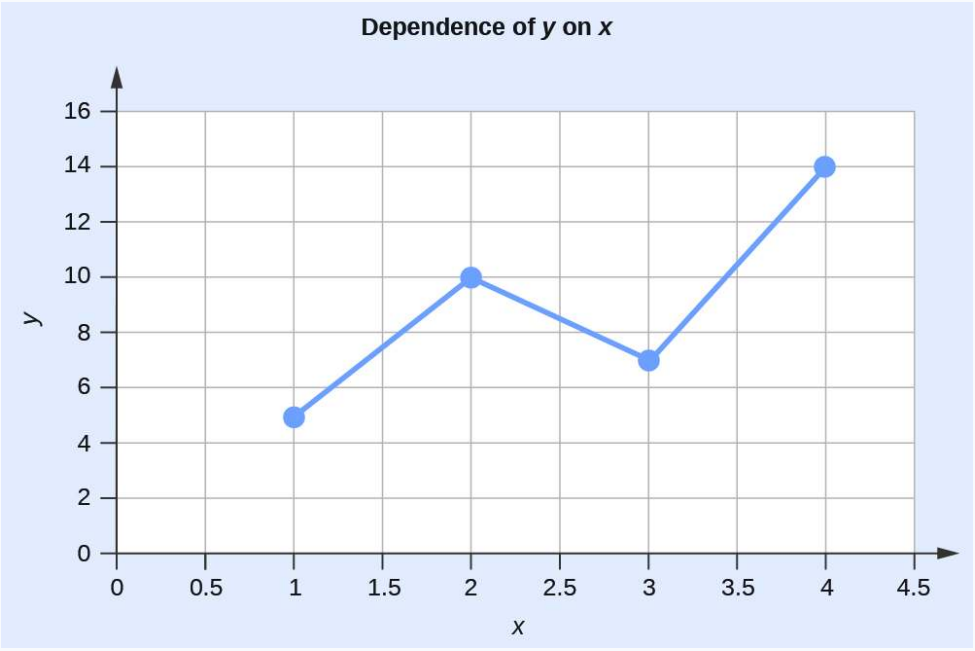

If the function that describes the dependence of *y* on *x* is known, it may be used to compute x,y data pairs that may subsequently be plotted.

Plotting Data Pairs If we know that $y = x^2 + 2$, we can produce a table of a few (x,y) values and then plot the line based on the data shown here.

x	$y = x^2 + 2$
1	3
2	6
3	11
4	18

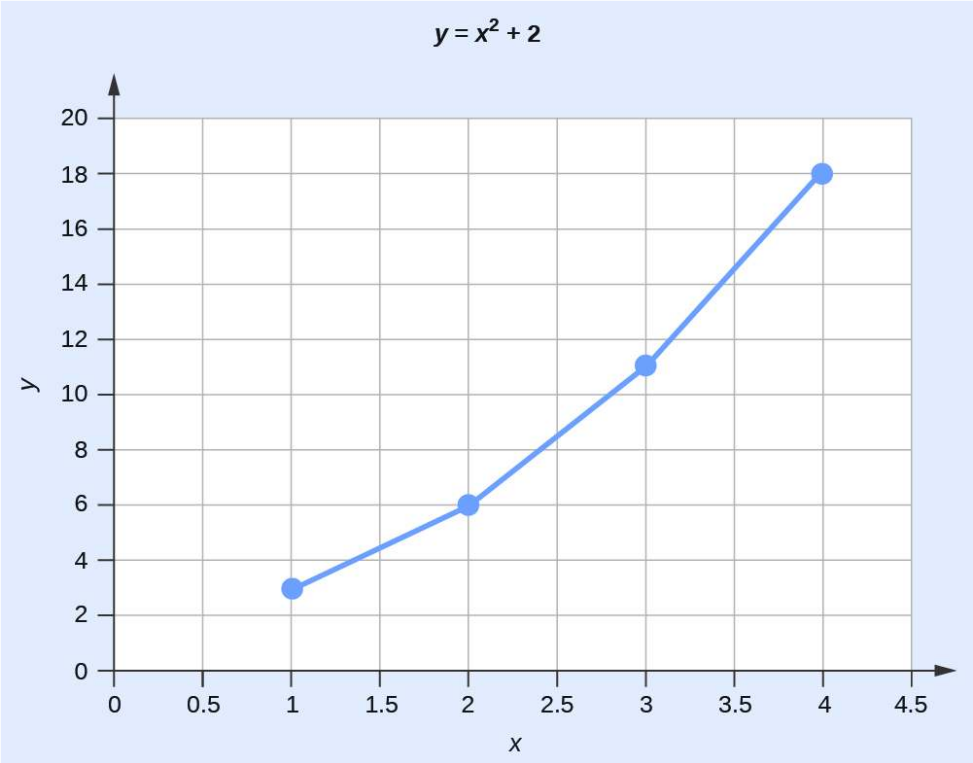

This page titled Appendix 1: Essential Mathematics Review is shared under a CC BY license and was authored, remixed, and/or curated by OpenStax.

CHAPTER OVERVIEW

2: Atoms, Molecules, and Ions

A general chemistry Libretexts Textmap organized around the textbook
General Chemistry -Atoms First
By OpenStax

I II III IV V VI VII VIII IX X XI XII XIII XIV XV XVI XVII XVIII XIX XX XXI ● **Homework**

This chapter will describe some of the fundamental chemical principles related to the composition of matter, including those central to the concept of molecular identity.

2.1: Atomic Structure and Symbolism
2.2: Chemical Formulas
2.3: The Periodic Table
2.4: Molecular and Ionic Compounds
2.5: Chemical Nomenclature

Contributors

- Paul Flowers (University of North Carolina - Pembroke), Klaus Theopold (University of Delaware) and Richard Langley (Stephen F. Austin State University) with contributing authors. Textbook content produced by OpenStax College is licensed under a Creative Commons Attribution License 4.0 license. Download for free at http://cnx.org/contents/85abf193-2bd...a7ac8df6@9.110).

This page titled 2: Atoms, Molecules, and Ions is shared under a CC BY license and was authored, remixed, and/or curated by OpenStax.

2.1: Atomic Structure and Symbolism

Skills to Develop

- Write and interpret symbols that depict the atomic number, mass number, and charge of an atom or ion
- Define the atomic mass unit and average atomic mass
- Calculate average atomic mass and isotopic abundance

The development of modern atomic theory revealed much about the inner structure of atoms. It was learned that an atom contains a very small nucleus composed of positively charged protons and uncharged neutrons, surrounded by a much larger volume of space containing negatively charged electrons. The nucleus contains the majority of an atom's mass because protons and neutrons are much heavier than electrons, whereas electrons occupy almost all of an atom's volume. The diameter of an atom is on the order of 10^{-10} m, whereas the diameter of the nucleus is roughly 10^{-15} m—about 100,000 times smaller. For a perspective about their relative sizes, consider this: If the nucleus were the size of a blueberry, the atom would be about the size of a football stadium (Figure **2.1.1**).

Figure **2.1.1**: If an atom could be expanded to the size of a football stadium, the nucleus would be the size of a single blueberry. (credit middle: modification of work by "babyknight"/Wikimedia Commons; credit right: modification of work by Paxson Woelber).

Atoms—and the protons, neutrons, and electrons that compose them—are extremely small. For example, a carbon atom weighs less than 2×10^{-23} g, and an electron has a charge of less than 2×10^{-19} C (coulomb). When describing the properties of tiny objects such as atoms, we use appropriately small units of measure, such as the atomic mass unit (amu) and the fundamental unit of charge (e). The amu was originally defined based on hydrogen, the lightest element, then later in terms of oxygen. Since 1961, it has been defined with regard to the most abundant isotope of carbon, atoms of which are assigned masses of exactly 12 amu. (This isotope is known as "carbon-12" as will be discussed later in this module.) Thus, one amu is exactly $\mathbf{1/12}$ of the mass of one carbon-12 atom: 1 amu = 1.6605×10^{-24} g. (The Dalton (Da) and the unified atomic mass unit (u) are alternative units that are equivalent to the amu.) The fundamental unit of charge (also called the elementary charge) equals the magnitude of the charge of an electron (e) with e = 1.602×10^{-19} C.

A proton has a mass of 1.0073 amu and a charge of 1+. A neutron is a slightly heavier particle with a mass 1.0087 amu and a charge of zero; as its name suggests, it is neutral. The electron has a charge of 1− and is a much lighter particle with a mass of about 0.00055 amu (it would take about 1800 electrons to equal the mass of one proton. The properties of these fundamental particles are summarized in Table **2.1.1**. (An observant student might notice that the sum of an atom's subatomic particles does not equal the atom's actual mass: The total mass of six protons, six neutrons, and six electrons is 12.0993 amu, slightly larger than the 12.00 amu of an actual carbon-12 atom. This "missing" mass is known as the mass defect, and you will learn about it in the chapter on nuclear chemistry.)

***Table* 2.1.1**: *Properties of Subatomic Particles*

Name	Location	Charge (C)	Unit Charge	Mass (amu)	Mass (g)
electron	outside nucleus	$\mathbf{-1.602 \times 10^{-19}}$	1−	0.00055	$\mathbf{0.00091 \times 10^{-24}}$
proton	nucleus	$\mathbf{1.602 \times 10^{-19}}$	1+	1.00727	$\mathbf{1.67262 \times 10^{-24}}$
neutron	nucleus	0	0	1.00866	$\mathbf{1.67493 \times 10^{-24}}$

The number of protons in the nucleus of an atom is its atomic number (Z). This is the defining trait of an element: Its value determines the identity of the atom. For example, any atom that contains six protons is the element carbon and has the atomic number 6, regardless of how many neutrons or electrons it may have. A neutral atom must contain the same number of positive and negative charges, so the number of protons equals the number of electrons. Therefore, the atomic number also indicates the number of electrons in an atom. The total number of protons and neutrons in an atom is called its mass number (A). The number of neutrons is therefore the difference between the mass number and the atomic number: A – Z = number of neutrons.

$$\begin{aligned} \text{atomic number (Z)} &= \text{number of protons} \\ \text{mass number (A)} &= \text{number of protons} + \text{number of neutrons} \\ \text{A} - \text{Z} &= \text{number of neutrons} \end{aligned}$$

Atoms are electrically neutral if they contain the same number of positively charged protons and negatively charged electrons. When the numbers of these subatomic particles are *not* equal, the atom is electrically charged and is called an ion. The charge of an atom is defined as follows:

$$\text{Atomic charge} = \text{number of protons} - \text{number of electrons}$$

As will be discussed in more detail later in this chapter, atoms (and molecules) typically acquire charge by gaining or losing electrons. An atom that gains one or more electrons will exhibit a negative charge and is called an anion. Positively charged atoms called cations are formed when an atom loses one or more electrons. For example, a neutral sodium atom (Z = 11) has 11 electrons. If this atom loses one electron, it will become a cation with a 1+ charge (11 − 10 = 1+). A neutral oxygen atom (Z = 8) has eight electrons, and if it gains two electrons it will become an anion with a 2− charge (8 − 10 = 2−).

Example 2.1.1: Composition of an Atom

Iodine is an essential trace element in our diet; it is needed to produce thyroid hormone. Insufficient iodine in the diet can lead to the development of a goiter, an enlargement of the thyroid gland (Figure **2.1.2**).

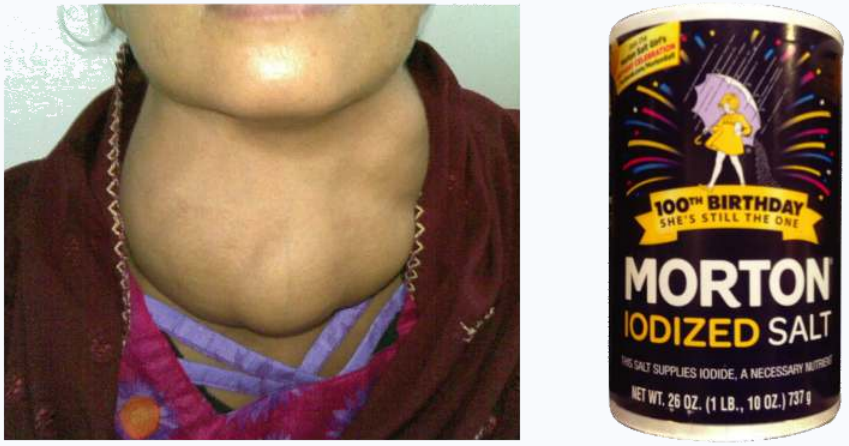

(a) (b)

Figure **2.1.2**: (a) Insufficient iodine in the diet can cause an enlargement of the thyroid gland called a goiter. (b) The addition of small amounts of iodine to salt, which prevents the formation of goiters, has helped eliminate this concern in the US where salt consumption is high. (credit a: modification of work by “Almazi”/Wikimedia Commons; credit b: modification of work by Mike Mozart)

The addition of small amounts of iodine to table salt (iodized salt) has essentially eliminated this health concern in the United States, but as much as 40% of the world’s population is still at risk of iodine deficiency. The iodine atoms are added as anions, and each has a 1− charge and a mass number of 127. Determine the numbers of protons, neutrons, and electrons in one of these iodine anions.

Solution

The atomic number of iodine (53) tells us that a neutral iodine atom contains 53 protons in its nucleus and 53 electrons outside its nucleus. Because the sum of the numbers of protons and neutrons equals the mass number, 127, the number of neutrons is 74 (127 − 53 = 74). Since the iodine is added as a 1− anion, the number of electrons is 54 [53 – (1–) = 54].

Exercise 2.1.1

An ion of platinum has a mass number of 195 and contains 74 electrons. How many protons and neutrons does it contain, and what is its charge?

Answer

78 protons; 117 neutrons; charge is 4+

Chemical Symbols

A chemical symbol is an abbreviation that we use to indicate an element or an atom of an element. For example, the symbol for mercury is Hg (Figure 2.1.3). We use the same symbol to indicate one atom of mercury (microscopic domain) or to label a container of many atoms of the element mercury (macroscopic domain).

Figure 2.1.3: The symbol Hg represents the element mercury regardless of the amount; it could represent one atom of mercury or a large amount of mercury. Image used with permission from Wikipedia (user: Materialscientist).

The symbols for several common elements and their atoms are listed in Table 2.1.2. Some symbols are derived from the common name of the element; others are abbreviations of the name in another language. Symbols have one or two letters, for example, H for hydrogen and Cl for chlorine. To avoid confusion with other notations, only the first letter of a symbol is capitalized. For example, Co is the symbol for the element cobalt, but CO is the notation for the compound carbon monoxide, which contains atoms of the elements carbon (C) and oxygen (O). All known elements and their symbols are in the periodic table.

Table 2.1.2: *Some Common Elements and Their Symbols*

Element	Symbol	Element	Symbol
aluminum	Al	iron	Fe (from *ferrum*)
bromine	Br	lead	Pb (from *plumbum*)
calcium	Ca	magnesium	Mg
carbon	C	mercury	Hg (from *hydrargyrum*)
chlorine	Cl	nitrogen	N
chromium	Cr	oxygen	O
cobalt	Co	potassium	K (from *kalium*)
copper	Cu (from *cuprum*)	silicon	Si
fluorine	F	silver	Ag (from *argentum*)
gold	Au (from *aurum*)	sodium	Na (from *natrium*)
helium	He	sulfur	S
hydrogen	H	tin	Sn (from *stannum*)
iodine	I	zinc	Zn

Traditionally, the discoverer (or discoverers) of a new element names the element. However, until the name is recognized by the International Union of Pure and Applied Chemistry (IUPAC), the recommended name of the new element is based on the Latin word(s) for its atomic number. For example, element 106 was called unnilhexium (Unh), element 107 was called unnilseptium (Uns), and element 108 was called unniloctium (Uno) for several years. These elements are now named after scientists or locations; for example, element 106 is now known as *seaborgium* (Sg) in honor of Glenn Seaborg, a Nobel Prize winner who was active in the discovery of several heavy elements.

Isotopes

The symbol for a specific isotope of any element is written by placing the mass number as a superscript to the left of the element symbol (Figure **2.1.4**). The atomic number is sometimes written as a subscript preceding the symbol, but since this number defines the element's identity, as does its symbol, it is often omitted. For example, magnesium exists as a mixture of three isotopes, each with an atomic number of 12 and with mass numbers of 24, 25, and 26, respectively. These isotopes can be identified as ^{24}Mg, ^{25}Mg, and ^{26}Mg. These isotope symbols are read as "element, mass number" and can be symbolized consistent with this reading. For instance, ^{24}Mg is read as "magnesium 24," and can be written as "magnesium-24" or "Mg-24." ^{25}Mg is read as "magnesium 25," and can be written as "magnesium-25" or "Mg-25." All magnesium atoms have 12 protons in their nucleus. They differ only because a ^{24}Mg atom has 12 neutrons in its nucleus, a ^{25}Mg atom has 13 neutrons, and a ^{26}Mg has 14 neutrons.

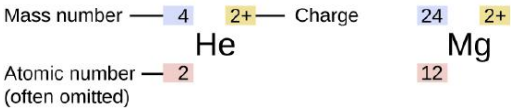

Figure **2.1.4**: The symbol for an atom indicates the element via its usual two-letter symbol, the mass number as a left superscript, the atomic number as a left subscript (sometimes omitted), and the charge as a right superscript.

Information about the naturally occurring isotopes of elements with atomic numbers 1 through 10 is given in Table **2.1.2**. Note that in addition to standard names and symbols, the isotopes of hydrogen are often referred to using common names and accompanying symbols. Hydrogen-2, symbolized ^{2}H, is also called deuterium and sometimes symbolized D. Hydrogen-3, symbolized ^{3}H, is also called tritium and sometimes symbolized T.

***Table* 2.1.2**: *Nuclear Compositions of Atoms of the Very Light Elements*

Element	Symbol	Atomic Number	Number of Protons	Number of Neutrons	Mass (amu)	% Natural Abundance
hydrogen	$^{1}_{1}\mathrm{H}$ (protium)	1	1	0	1.0078	99.989
	$^{2}_{1}\mathrm{H}$ (deuterium)	1	1	1	2.0141	0.0115
	$^{3}_{1}\mathrm{H}$ (tritium)	1	1	2	3.01605	— (trace)
helium	$^{3}_{2}\mathrm{He}$	2	2	1	3.01603	0.00013
	$^{4}_{2}\mathrm{He}$	2	2	2	4.0026	100
lithium	$^{6}_{3}\mathrm{Li}$	3	3	3	6.0151	7.59
	$^{7}_{3}\mathrm{Li}$	3	3	4	7.0160	92.41
beryllium	$^{9}_{4}\mathrm{Be}$	4	4	5	9.0122	100
boron	$^{10}_{5}\mathrm{B}$	5	5	5	10.0129	19.9
	$^{11}_{5}\mathrm{B}$	5	5	6	11.0093	80.1
carbon	$^{12}_{6}\mathrm{C}$	6	6	6	12.0000	98.89
	$^{13}_{6}\mathrm{C}$	6	6	7	13.0034	1.11
	$^{14}_{6}\mathrm{C}$	6	6	8	14.0032	— (trace)
nitrogen	$^{14}_{7}\mathrm{N}$	7	7	7	14.0031	99.63
	$^{15}_{7}\mathrm{N}$	7	7	8	15.0001	0.37
oxygen	$^{16}_{8}\mathrm{O}$	8	8	8	15.9949	99.757
	$^{17}_{8}\mathrm{O}$	8	8	9	16.9991	0.038
	$^{18}_{8}\mathrm{O}$	8	8	10	17.9992	0.205
fluorine	$^{19}_{9}\mathrm{F}$	9	9	10	18.9984	100
neon	$^{20}_{10}\mathrm{Ne}$	10	10	10	19.9924	90.48
	$^{21}_{10}\mathrm{Ne}$	10	10	11	20.9938	0.27
	$^{22}_{10}\mathrm{Ne}$	10	10	12	21.9914	9.25

Atomic Mass

Because each proton and each neutron contribute approximately one amu to the mass of an atom, and each electron contributes far less, the atomic mass of a single atom is approximately equal to its mass number (a whole number). However, the average masses of atoms of most elements are not whole numbers because most elements exist naturally as mixtures of two or more isotopes.

The mass of an element shown in a periodic table or listed in a table of atomic masses is a weighted, average mass of all the isotopes present in a naturally occurring sample of that element. This is equal to the sum of each individual isotope's mass multiplied by its fractional abundance.

$$\text{average mass} = \sum_i (\text{fractional abundance} \times \text{isotopic mass})_i \tag{2.1.1}$$

For example, the element boron is composed of two isotopes: About 19.9% of all boron atoms are ^{10}B with a mass of 10.0129 amu, and the remaining 80.1% are ^{11}B with a mass of 11.0093 amu. The average atomic mass for boron is calculated to be:

$$\begin{aligned}\text{boron average mass} &= (0.199 \times 10.0129\ \text{amu}) + (0.801 \times 11.0093\ \text{amu}) \\ &= 1.99\ \text{amu} + 8.82\ \text{amu} \\ &= 10.81\ \text{amu}\end{aligned}$$

It is important to understand that no single boron atom weighs exactly 10.8 amu; 10.8 amu is the average mass of all boron atoms, and individual boron atoms weigh either approximately 10 amu or 11 amu.

Example 2.1.2: Calculation of Average Atomic Mass

A meteorite found in central Indiana contains traces of the noble gas neon picked up from the solar wind during the meteorite's trip through the solar system. Analysis of a sample of the gas showed that it consisted of 91.84% ^{20}Ne (mass 19.9924 amu), 0.47% ^{21}Ne (mass 20.9940 amu), and 7.69% ^{22}Ne (mass 21.9914 amu). What is the average mass of the neon in the solar wind?

Solution

$$\begin{aligned}\text{average mass} &= (0.9184 \times 19.9924\ \text{amu}) + (0.0047 \times 20.9940\ \text{amu}) + (0.0769 \times 21.9914\ \text{amu}) \\ &= (18.36 + 0.099 + 1.69)\ \text{amu} \\ &= 20.15\ \text{amu}\end{aligned}$$

The average mass of a neon atom in the solar wind is 20.15 amu. (The average mass of a terrestrial neon atom is 20.1796 amu. This result demonstrates that we may find slight differences in the natural abundance of isotopes, depending on their origin.)

Exercise 2.1.2

A sample of magnesium is found to contain 78.70% of ^{24}Mg atoms (mass 23.98 amu), 10.13% of ^{25}Mg atoms (mass 24.99 amu), and 11.17% of ^{26}Mg atoms (mass 25.98 amu). Calculate the average mass of a Mg atom.

Answer

24.31 amu

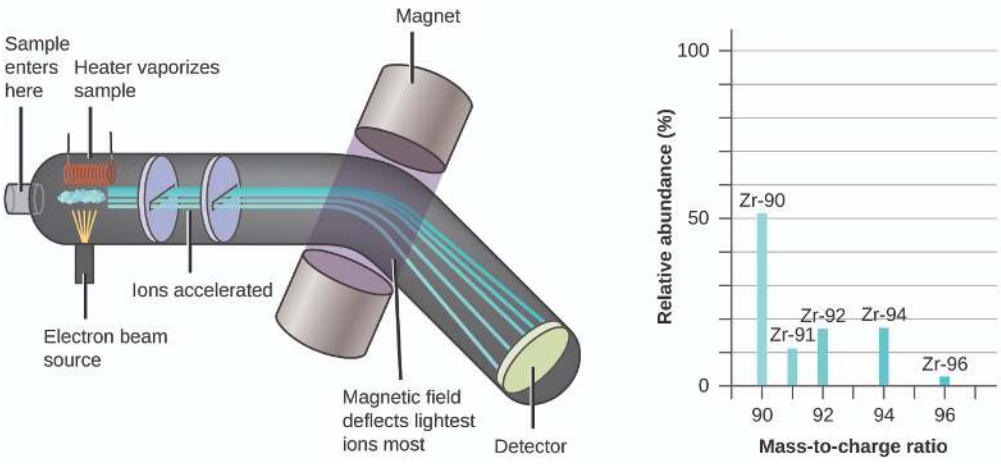

Figure* 2.1.5*: *Analysis of zirconium in a mass spectrometer produces a mass spectrum with peaks showing the different isotopes of Zr.*

The occurrence and natural abundances of isotopes can be experimentally determined using an instrument called a mass spectrometer. Mass spectrometry (MS) is widely used in chemistry, forensics, medicine, environmental science, and many other fields to analyze and help identify the substances in a sample of material. In a typical mass spectrometer (Figure **2.1.5**), the sample is vaporized and exposed to a high-energy electron beam that causes the sample's atoms (or molecules) to become electrically charged, typically by losing one or more electrons. These cations then pass through a (variable) electric or magnetic field that

deflects each cation's path to an extent that depends on both its mass and charge (similar to how the path of a large steel ball bearing rolling past a magnet is deflected to a lesser extent that that of a small steel BB). The ions are detected, and a plot of the relative number of ions generated versus their mass-to-charge ratios (a *mass spectrum*) is made. The height of each vertical feature or peak in a mass spectrum is proportional to the fraction of cations with the specified mass-to-charge ratio. Since its initial use during the development of modern atomic theory, MS has evolved to become a powerful tool for chemical analysis in a wide range of applications.

Video* 2.1.1: Watch this video from the Royal Society for Chemistry for a brief description of the rudiments of mass spectrometry.*

Summary

An atom consists of a small, positively charged nucleus surrounded by electrons. The nucleus contains protons and neutrons; its diameter is about 100,000 times smaller than that of the atom. The mass of one atom is usually expressed in atomic mass units (amu), which is referred to as the atomic mass. An amu is defined as exactly $\mathbf{1/12}$ of the mass of a carbon-12 atom and is equal to 1.6605×10^{-24} g.

Protons are relatively heavy particles with a charge of 1+ and a mass of 1.0073 amu. Neutrons are relatively heavy particles with no charge and a mass of 1.0087 amu. Electrons are light particles with a charge of 1− and a mass of 0.00055 amu. The number of protons in the nucleus is called the atomic number (Z) and is the property that defines an atom's elemental identity. The sum of the numbers of protons and neutrons in the nucleus is called the mass number and, expressed in amu, is approximately equal to the mass of the atom. An atom is neutral when it contains equal numbers of electrons and protons.

Isotopes of an element are atoms with the same atomic number but different mass numbers; isotopes of an element, therefore, differ from each other only in the number of neutrons within the nucleus. When a naturally occurring element is composed of several isotopes, the atomic mass of the element represents the average of the masses of the isotopes involved. A chemical symbol identifies the atoms in a substance using symbols, which are one-, two-, or three-letter abbreviations for the atoms.

Key Equations

- $\mathbf{\text{average mass} = \sum_i (\text{fractional abundance} \times \text{isotopic mass})_i}$

Glossary

anion

negatively charged atom or molecule (contains more electrons than protons)

atomic mass

average mass of atoms of an element, expressed in amu

atomic mass unit (amu)

(also, unified atomic mass unit, u, or Dalton, Da) unit of mass equal to $\frac{1}{12}$ of the mass of a ^{12}C atom

atomic number (Z)

number of protons in the nucleus of an atom

cation

positively charged atom or molecule (contains fewer electrons than protons)

chemical symbol

one-, two-, or three-letter abbreviation used to represent an element or its atoms

Dalton (Da)

alternative unit equivalent to the atomic mass unit

fundamental unit of charge

(also called the elementary charge) equals the magnitude of the charge of an electron (e) with $e = 1.602 \times 10^{-19}$ C

ion

electrically charged atom or molecule (contains unequal numbers of protons and electrons)

mass number (A)

sum of the numbers of neutrons and protons in the nucleus of an atom

unified atomic mass unit (u)

alternative unit equivalent to the atomic mass unit

Contributors

- Paul Flowers (University of North Carolina - Pembroke), Klaus Theopold (University of Delaware) and Richard Langley (Stephen F. Austin State University) with contributing authors. Textbook content produced by OpenStax College is licensed under a Creative Commons Attribution License 4.0 license. Download for free at http://cnx.org/contents/85abf193-2bd...a7ac8df6@9.110).

This page titled 2.1: Atomic Structure and Symbolism is shared under a CC BY license and was authored, remixed, and/or curated by OpenStax.

2.2: Chemical Formulas

Learning Objectives

- Symbolize the composition of molecules using molecular formulas and empirical formulas
- Represent the bonding arrangement of atoms within molecules using structural formulas

A molecular formula is a representation of a molecule that uses chemical symbols to indicate the types of atoms followed by subscripts to show the number of atoms of each type in the molecule. (A subscript is used only when more than one atom of a given type is present.) Molecular formulas are also used as abbreviations for the names of compounds.

The structural formula for a compound gives the same information as its molecular formula (the types and numbers of atoms in the molecule) but also shows how the atoms are connected in the molecule. The structural formula for methane contains symbols for one C atom and four H atoms, indicating the number of atoms in the molecule (Figure **2.2.1**). The lines represent bonds that hold the atoms together. (A chemical bond is an attraction between atoms or ions that holds them together in a molecule or a crystal.) We will discuss chemical bonds and see how to predict the arrangement of atoms in a molecule later. For now, simply know that the lines are an indication of how the atoms are connected in a molecule. A ball-and-stick model shows the geometric arrangement of the atoms with atomic sizes not to scale, and a space-filling model shows the relative sizes of the atoms.

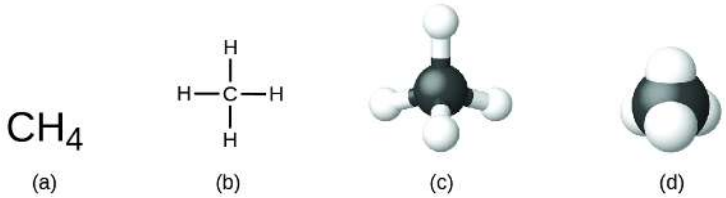

Figure **2.2.1**: A methane molecule can be represented as (a) a molecular formula, (b) a structural formula, (c) a ball-and-stick model, and (d) a space-filling model. Carbon and hydrogen atoms are represented by black and white spheres, respectively.

Figure A shows C H subscript 4. Figure B shows a carbon atom that is bonded to four hydrogen atoms at right angles: one above, one to the left, one to the right, and one below. Figure C shows a 3-D, ball-and-stick model of the carbon atom bonded to four hydrogen atoms. Figure D shows a space-filling model of a carbon atom with hydrogen atoms partially embedded into the surface of the carbon atom.

Although many elements consist of discrete, individual atoms, some exist as molecules made up of two or more atoms of the element chemically bonded together. For example, most samples of the elements hydrogen, oxygen, and nitrogen are composed of molecules that contain two atoms each (called diatomic molecules) and thus have the molecular formulas H_2, O_2, and N_2, respectively. Other elements commonly found as diatomic molecules are fluorine (F_2), chlorine (Cl_2), bromine (Br_2), and iodine (I_2). The most common form of the element sulfur is composed of molecules that consist of eight atoms of sulfur; its molecular formula is S_8 (Figure **2.2.2**).

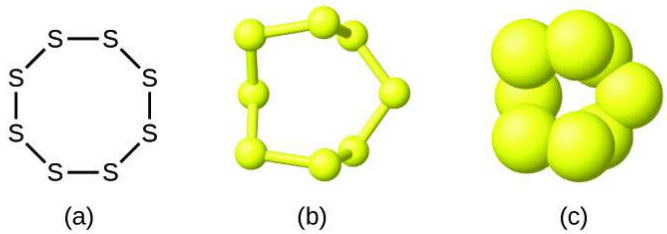

Figure **2.2.2**: A molecule of sulfur is composed of eight sulfur atoms and is therefore written as S_8. It can be represented as (a) a structural formula, (b) a ball-and-stick model, and (c) a space-filling model. Sulfur atoms are represented by yellow spheres.

Figure A shows eight sulfur atoms, symbolized with the letter S, that are bonded to each other to form an octagon. Figure B shows a 3-D, ball-and-stick model of the arrangement of the sulfur atoms. The shape is clearly not octagonal as it is represented in the structural formula. Figure C is a space-filling model that shows each sulfur atom is partially embedded into the sulfur atom it bonds with.

It is important to note that a subscript following a symbol and a number in front of a symbol do not represent the same thing; for example, H_2 and 2H represent distinctly different species. H_2 is a molecular formula; it represents a diatomic molecule of hydrogen, consisting of two atoms of the element that are chemically bonded together. The expression 2H, on the other hand,

indicates two separate hydrogen atoms that are not combined as a unit. The expression $2H_2$ represents two molecules of diatomic hydrogen (Figure **2.2.3**).

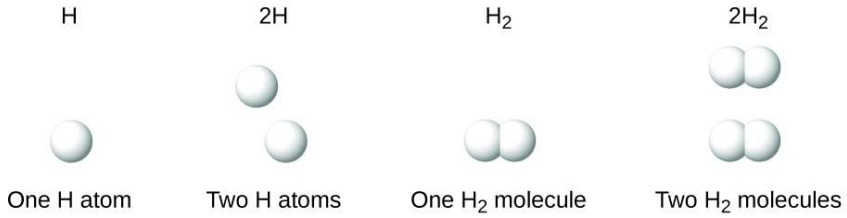

Figure **2.2.3**: The symbols H, 2H, H_2, and $2H_2$ represent very different entities.

This figure shows four diagrams. The diagram for H shows a single, white sphere and is labeled one H atom. The diagram for 2 H shows two white spheres that are not bonded together. It is labeled 2 H atoms. The diagram for H subscript 2 shows two white spheres bonded together. It is labeled one H subscript 2 molecule. The diagram for 2 H subscript 2 shows two sets of bonded, white spheres. It is labeled 2 H subscript 2 molecules.

Compounds are formed when two or more elements chemically combine, resulting in the formation of bonds. For example, hydrogen and oxygen can react to form water, and sodium and chlorine can react to form table salt. We sometimes describe the composition of these compounds with an empirical formula, which indicates the types of atoms present and *the simplest whole-number ratio of the number of atoms (or ions) in the compound*. For example, titanium dioxide (used as pigment in white paint and in the thick, white, blocking type of sunscreen) has an empirical formula of TiO_2. This identifies the elements titanium (Ti) and oxygen (O) as the constituents of titanium dioxide, and indicates the presence of twice as many atoms of the element oxygen as atoms of the element titanium (Figure **2.2.4**).

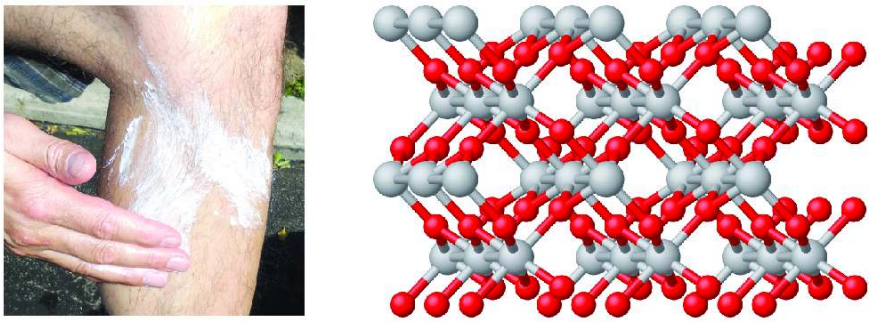

Figure **2.2.4**: (a) The white compound titanium dioxide provides effective protection from the sun. (b) A crystal of titanium dioxide, TiO_2, contains titanium and oxygen in a ratio of 1 to 2. The titanium atoms are gray and the oxygen atoms are red. (credit a: modification of work by “osseous”/Flickr).

Figure A shows a photo of a person applying suntan lotion to his or her lower leg. Figure B shows a 3-D ball-and-stick model of the molecule titanium dioxide, which involves a complicated interlocking of many titanium and oxygen atoms. The titanium atoms in the molecule are shown as silver spheres and the oxygen atoms are shown as red spheres. There are twice as many oxygen atoms as titanium atoms in the molecule.

As discussed previously, we can describe a compound with a molecular formula, in which the subscripts indicate the *actual numbers of atoms* of each element in a molecule of the compound. In many cases, the molecular formula of a substance is derived from experimental determination of both its empirical formula and its molecular mass (the sum of atomic masses for all atoms composing the molecule). For example, it can be determined experimentally that benzene contains two elements, carbon (C) and hydrogen (H), and that for every carbon atom in benzene, there is one hydrogen atom. Thus, the empirical formula is CH. An experimental determination of the molecular mass reveals that a molecule of benzene contains six carbon atoms and six hydrogen atoms, so the molecular formula for benzene is C_6H_6 (Figure **2.2.5**).

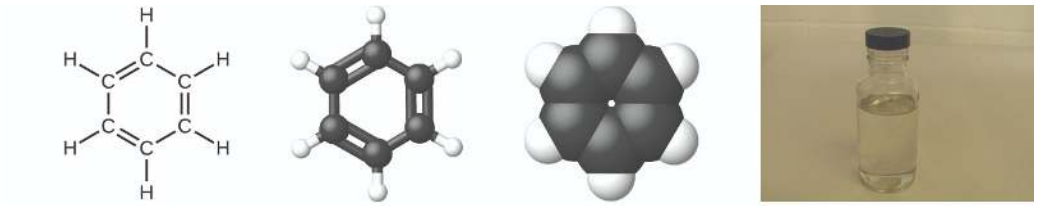

Figure **2.2.5**: Benzene, C_6H_6, is produced during oil refining and has many industrial uses. A benzene molecule can be represented as (a) a structural formula, (b) a ball-and-stick model, and (c) a space-filling model. (d) Benzene is a clear liquid. (credit d: modification of work by Sahar Atwa).

Figure A shows that benzene is composed of six carbons shaped like a hexagon. Every other bond between the carbon atoms is a double bond. Each carbon also has a single bonded hydrogen atom. Figure B shows a 3-D, ball-and-stick drawing of benzene. The six carbon atoms are black spheres while the six hydrogen atoms are smaller, white spheres. Figure C is a space-filling model of benzene which shows that most of the interior space is occupied by the carbon atoms. The hydrogen atoms are embedded in the outside surface of the carbon atoms. Figure d shows a small vial filled with benzene which appears to be clear.

If we know a compound's formula, we can easily determine the empirical formula. (This is somewhat of an academic exercise; the reverse chronology is generally followed in actual practice.) For example, the molecular formula for acetic acid, the component that gives vinegar its sharp taste, is $C_2H_4O_2$. This formula indicates that a molecule of acetic acid (Figure **2.2.6**) contains two carbon atoms, four hydrogen atoms, and two oxygen atoms. The ratio of atoms is 2:4:2. Dividing by the lowest common denominator (2) gives the simplest, whole-number ratio of atoms, 1:2:1, so the empirical formula is CH_2O. Note that a molecular formula is always a whole-number multiple of an empirical formula.

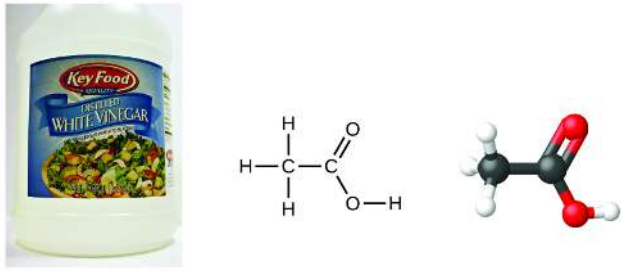

Figure **2.2.6**: (a) Vinegar contains acetic acid, $C_2H_4O_2$, which has an empirical formula of CH_2O. It can be represented as (b) a structural formula and (c) as a ball-and-stick model. (credit a: modification of work by "HomeSpot HQ"/Flickr)

Figure A shows a jug of distilled, white vinegar. Figure B shows a structural formula for acetic acid which contains two carbon atoms connected by a single bond. The left carbon atom forms single bonds with three hydrogen atoms. The right carbon atom forms a double bond with an oxygen atom. The right carbon atom also forms a single bond with an oxygen atom. This oxygen forms a single bond with a hydrogen atom. Figure C shows a 3-D ball-and-stick model of acetic acid.

✔ Example **2.2.1**: Empirical and Molecular Formulas

Molecules of glucose (blood sugar) contain 6 carbon atoms, 12 hydrogen atoms, and 6 oxygen atoms. What are the molecular and empirical formulas of glucose?

Solution

The molecular formula is $C_6H_{12}O_6$ because one molecule actually contains 6 C, 12 H, and 6 O atoms. The simplest whole-number ratio of C to H to O atoms in glucose is 1:2:1, so the empirical formula is CH_2O.

? Exercise **2.2.1**

A molecule of metaldehyde (a pesticide used for snails and slugs) contains 8 carbon atoms, 16 hydrogen atoms, and 4 oxygen atoms. What are the molecular and empirical formulas of metaldehyde?

Answer

Molecular formula, $C_8H_{16}O_4$; empirical formula, C_2H_4O

It is important to be aware that it may be possible for the same atoms to be arranged in different ways: Compounds with the same molecular formula may have different atom-to-atom bonding and therefore different structures. For example, could there be another compound with the same formula as acetic acid, $C_2H_4O_2$? And if so, what would be the structure of its molecules?

If you predict that another compound with the formula $C_2H_4O_2$ could exist, then you demonstrated good chemical insight and are correct. Two C atoms, four H atoms, and two O atoms can also be arranged to form methyl formate, which is used in manufacturing, as an insecticide, and for quick-drying finishes. Methyl formate molecules have one of the oxygen atoms between the two carbon atoms, differing from the arrangement in acetic acid molecules. Acetic acid and methyl formate are examples of isomers—compounds with the same chemical formula but different molecular structures (Figure **2.2.7**). Note that this small difference in the arrangement of the atoms has a major effect on their respective chemical properties. You would certainly not want to use a solution of methyl formate as a substitute for a solution of acetic acid (vinegar) when you make salad dressing.

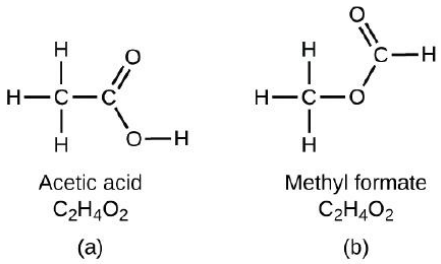

Figure **2.2.7**: Molecules of (a) acetic acid and methyl formate (b) are structural isomers; they have the same formula ($C_2H_4O_2$) but different structures (and therefore different chemical properties).

Figure A shows a structural diagram of acetic acid, C subscript 2 H subscript 4 O subscript 2. Acetic acid contains two carbon atoms connected by a single bond. The left carbon atom forms single bonds with three hydrogen atoms. The carbon on the right forms a double bond with an oxygen atom. The right carbon atom also forms a single bond to an oxygen atom which forms a single bond with a hydrogen atom. Figure B shows a structural diagram of methyl formate, C subscript 2 H subscript 4 O subscript 2. This molecule contains a carbon atom which forms single bonds with three hydrogen atoms, and a single bond with an oxygen atom. The oxygen atom forms a single bond with another carbon atom which forms a double bond with another oxygen atom and a single bond with a hydrogen atom.

Many types of isomers exist (Figure **2.2.8**). Acetic acid and methyl formate are structural isomers, compounds in which the molecules differ in how the atoms are connected to each other. There are also various types of spatial isomers, in which the relative orientations of the atoms in space can be different. For example, the compound carvone (found in caraway seeds, spearmint, and mandarin orange peels) consists of two isomers that are mirror images of each other. *S*-(+)-carvone smells like caraway, and *R*-(−)-carvone smells like spearmint.

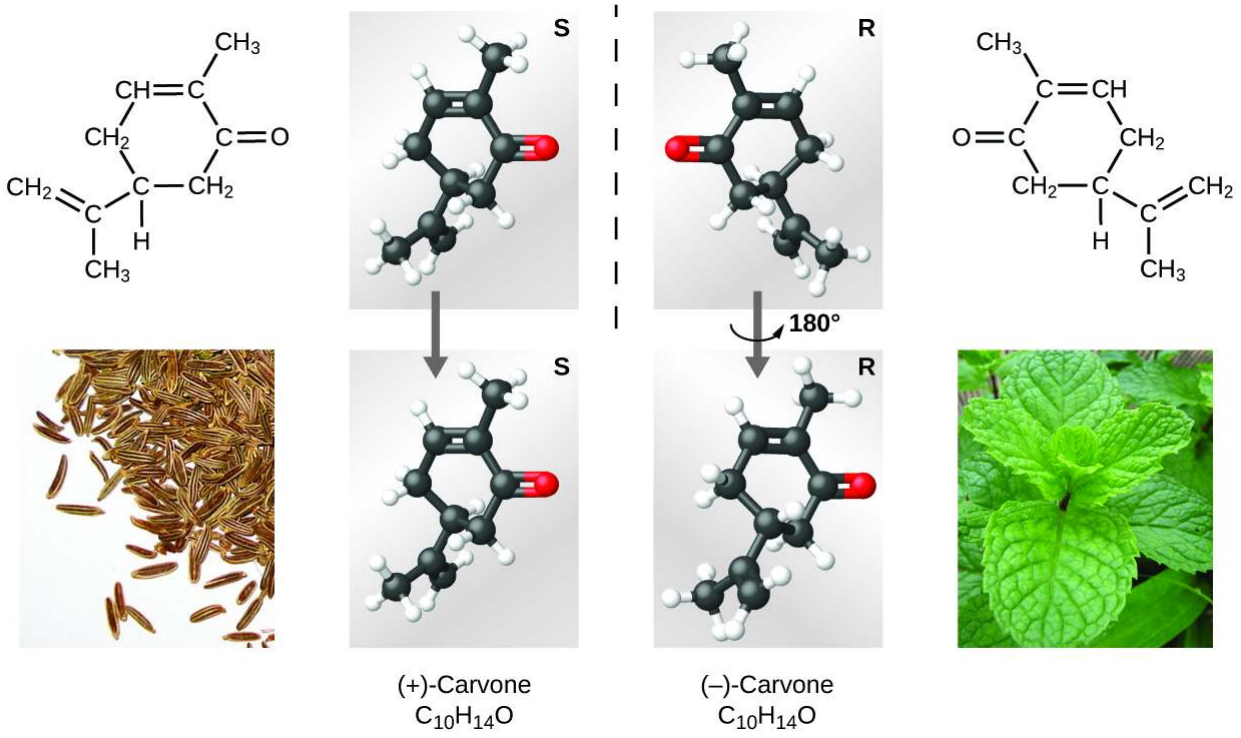

Figure **2.2.8**: Molecules of carvone are spatial isomers; they only differ in the relative orientations of the atoms in space. (credit bottom left: modification of work by "Miansari66"/Wikimedia Commons; credit bottom right: modification of work by Forest & Kim Starr)

Summary

A molecular formula uses chemical symbols and subscripts to indicate the exact numbers of different atoms in a molecule or compound. An empirical formula gives the simplest, whole-number ratio of atoms in a compound. A structural formula indicates the bonding arrangement of the atoms in the molecule. Ball-and-stick and space-filling models show the geometric arrangement of atoms in a molecule. Isomers are compounds with the same molecular formula but different arrangements of atoms.

Glossary

empirical formula
formula showing the composition of a compound given as the simplest whole-number ratio of atoms

isomers
compounds with the same chemical formula but different structures

molecular formula
formula indicating the composition of a molecule of a compound and giving the actual number of atoms of each element in a molecule of the compound.

spatial isomers
compounds in which the relative orientations of the atoms in space differ

structural isomer
one of two substances that have the same molecular formula but different physical and chemical properties because their atoms are bonded differently

structural formula

shows the atoms in a molecule and how they are connected

This page titled 2.2: Chemical Formulas is shared under a CC BY license and was authored, remixed, and/or curated by OpenStax.

- **2.5: Chemical Formulas** by OpenStax is licensed CC BY 4.0. Original source: https://openstax.org/details/books/chemistry-2e.

2.3: The Periodic Table

Learning Objectives

- State the periodic law and explain the organization of elements in the periodic table
- Predict the general properties of elements based on their location within the periodic table
- Identify metals, nonmetals, and metalloids by their properties and/or location on the periodic table

As early chemists worked to purify ores and discovered more elements, they realized that various elements could be grouped together by their similar chemical behaviors. One such grouping includes lithium (Li), sodium (Na), and potassium (K): These elements all are shiny, conduct heat and electricity well, and have similar chemical properties. A second grouping includes calcium (Ca), strontium (Sr), and barium (Ba), which also are shiny, good conductors of heat and electricity, and have chemical properties in common. However, the specific properties of these two groupings are notably different from each other. For example: Li, Na, and K are much more reactive than are Ca, Sr, and Ba; Li, Na, and K form compounds with oxygen in a ratio of two of their atoms to one oxygen atom, whereas Ca, Sr, and Ba form compounds with one of their atoms to one oxygen atom. Fluorine (F), chlorine (Cl), bromine (Br), and iodine (I) also exhibit similar properties to each other, but these properties are drastically different from those of any of the elements above.

Dimitri Mendeleev in Russia (1869) and Lothar Meyer in Germany (1870) independently recognized that there was a periodic relationship among the properties of the elements known at that time. Both published tables with the elements arranged according to increasing atomic mass. But Mendeleev went one step further than Meyer: He used his table to predict the existence of elements that would have the properties similar to aluminum and silicon, but were yet unknown. The discoveries of gallium (1875) and germanium (1886) provided great support for Mendeleev's work. Although Mendeleev and Meyer had a long dispute over priority, Mendeleev's contributions to the development of the periodic table are now more widely recognized (Figure **2.3.1**).



Reihen	Gruppo I. — R²O	Gruppo II. — RO	Gruppo III. — R²O³	Gruppo IV. RH⁴ RO²	Gruppo V. RH³ R²O⁵	Gruppo VI. RH² RO³	Gruppo VII. RH R²O⁷	Gruppo VIII. — RO⁴
1	H=1							
2	Li=7	Be=9,4	B=11	C=12	N=14	O=16	F=19	
3	Na=23	Mg=24	Al=27,3	Si=28	P=31	S=32	Cl=35,5	
4	K=39	Ca=40	—=44	Ti=48	V=51	Cr=52	Mn=55	Fe=56, Co=59, Ni=59, Cu=63.
5	(Cu=63)	Zn=65	—=68	—=72	As=75	Se=78	Br=80	
6	Rb=86	Sr=87	?Yt=88	Zr=90	Nb=94	Mo=96	—=100	Ru=104, Rh=104, Pd=106, Ag=108.
7	(Ag=108)	Cd=112	In=113	Sn=118	Sb=122	Te=125	J=127	
8	Cs=133	Ba=137	?Di=138	?Ce=140	—	—	—	— — — —
9	(—)	—	—	—	—	—	—	
10	—	—	?Er=178	?La=180	Ta=182	W=184	—	Os=195, Ir=197, Pt=198, Au=199.
11	(Au=199)	Hg=200	Tl=204	Pb=207	Bi=208	—	—	
12	—	—	—	Th=231	—	U=240	—	— — — —

(a) (b)

Figure **2.3.1**: (a) Dimitri Mendeleev is widely credited with creating (b) the first periodic table of the elements. (credit a: modification of work by Serge Lachinov; credit b: modification of work by “Den fjättrade ankan”/Wikimedia Commons)

Figure A shows a photograph of Dimitri Mendeleev. Figure B shows the first periodic table developed by Mendeleev, which had eight groups and twelve periods. In the first group (—, R superscript plus sign 0) is the following information: H = 1, L i = 7, N a = 23, K = 39, (C u = 63), R b = 85, (A g = 108), C a = 183, (—),—, (A u = 199) —. Note that each of these entries corresponds to one of the twelve periods respectively. The second group (—, R 0) contains the following information: (not entry for period 1) B o = 9, 4, M g = 24, C a = 40, Z n = 65, S r = 87, C d = 112, B a = 187, —, —, H g = 200, —. Note the ach of these entries corresponds to one of the twelve periods respectively. Group three (—, R superscript one 0 superscript nine) contains the information: (no entry for period 1), B = 11, A l = 27, 8. — = 44, — = 68, ? Y t = 88, I n = 113, ? D I = 138, —, ? E r = 178, T l = 204, —. Note that each of these entries corresponds to one of the twelve periods respectively. Group four (RH superscript four, R0 superscript eight) contains the following information: (no entry for period 1), C = 12, B i = 28, T i = 48, — = 72, Z r = 90, S n = 118, ? C o = 140, ? L a = 180, P b = 207, T h = 231. Note that each of these entries corresponds to one of the twelve periods respectively. Group five (R H superscript two, R superscript two 0 superscript five) contains the following information: (no entry for period 1), N = 14, P = 31, V = 51, A s = 75, N b = 94, S b = 122, —, —, T a = 182, B l = 208, —. Note that each of these entries corresponds to one of the twelve periods respectively. Group six (R H superscript two, R 0 superscript three) contains the following information: (no entry for period 1), O = 16, S = 32, C r = 52, S o = 78, M o = 96, T o = 125, —, —, W = 184, —, U = 240. Note that each of these entries corresponds to one of the twelve periods respectively. Group seven (R H , R superscript plus sing, 0 superscript 7) contains the following information: (no entry for period 1), F = 19, C l = 35, 5, M n = 55, B r = 80, — = 100, J = 127, —, —, —, —, —. Note that each of these entries corresponds to one of the twelve periods respectively. Group 8 (—, R 0 superscript four) contains the following information: (no entry for periods 1, 2, 3), in period 4: F o = 56, C o = 59, N i = 59, C u = 63, no entry for period five, in period 6: R u = 104, R h = 104, P d = 106, A g = 108, no entries for periods 7, 8 , or 9, in period 10: O s = 195, I r = 197, P t = 198, A u = 199, no entries for periods 11 or 12.

By the twentieth century, it became apparent that the periodic relationship involved atomic numbers rather than atomic masses. The modern statement of this relationship, the periodic law, is as follows: *the properties of the elements are periodic functions of their atomic numbers*. A modern periodic table arranges the elements in increasing order of their atomic numbers and groups atoms with similar properties in the same vertical column (Figure **2.3.2**). Each box represents an element and contains its atomic number, symbol, average atomic mass, and (sometimes) name. The elements are arranged in seven horizontal rows, called periods or series, and 18 vertical columns, called groups. Groups are labeled at the top of each column. In the United States, the labels traditionally were numerals with capital letters. However, IUPAC recommends that the numbers 1 through 18 be used, and these labels are more common. For the table to fit on a single page, parts of two of the rows, a total of 14 columns, are usually written below the main body of the table.

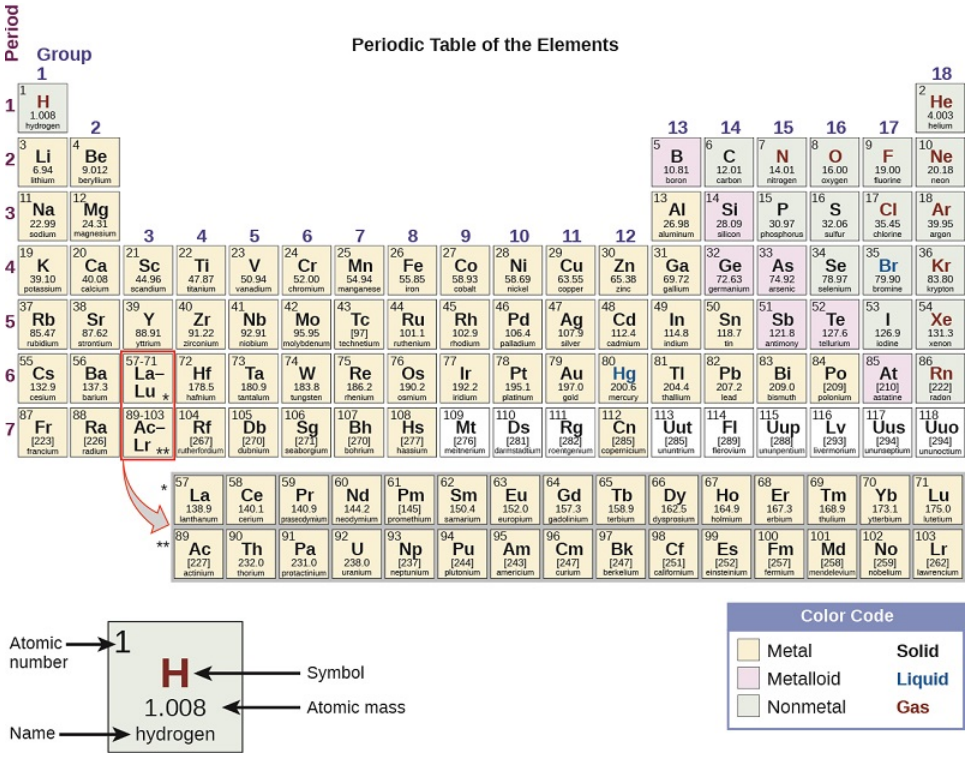

Figure 2.3.2: Elements in the periodic table are organized according to their properties.

https://chem.libretexts.org/@go/page/162448

The Periodic Table of Elements is shown. The 18 columns are labeled “Group” and the 7 rows are labeled “Period.” Below the table to the right is a box labeled “Color Code” with different colors for metals, metalloids, and nonmetals, as well as solids, liquids, and gases. To the left of this box is an enlarged picture of the upper-left most box on the table. The number 1 is in its upper-left hand corner and is labeled “Atomic number.” The letter “H” is in the middle in red indicating that it is a gas. It is labeled “Symbol.” Below that is the number 1.008 which is labeled “Atomic Mass.” Below that is the word hydrogen which is labeled “name.” The color of the box indicates that it is a nonmetal. Each element will be described in this order: atomic number; name; symbol; whether it is a metal, metalloid, or nonmetal; whether it is a solid, liquid, or gas; and atomic mass. Beginning at the top left of the table, or period 1, group 1, is a box containing “1; hydrogen; H; nonmetal; gas; and 1.008.” There is only one other element box in period 1, group 18, which contains “2; helium; H e; nonmetal; gas; and 4.003.” Period 2, group 1 contains “3; lithium; L i; metal; solid; and 6.94” Group 2 contains “4; beryllium; B e; metal; solid; and 9.012.” Groups 3 through 12 are skipped and group 13 contains “5; boron; B; metalloid; solid; 10.81.” Group 14 contains “6; carbon; C; nonmetal; solid; and 12.01.” Group 15 contains “7; nitrogen; N; nonmetal; gas; and 14.01.” Group 16 contains “8; oxygen; O; nonmetal; gas; and 16.00.” Group 17 contains “9; fluorine; F; nonmetal; gas; and 19.00.” Group 18 contains “10; neon; N e; nonmetal; gas; and 20.18.” Period 3, group 1 contains “11; sodium; N a; metal; solid; and 22.99.” Group 2 contains “12; magnesium; M g; metal; solid; and 24.31.” Groups 3 through 12 are skipped again in period 3 and group 13 contains “13; aluminum; A l; metal; solid; and 26.98.” Group 14 contains “14; silicon; S i; metalloid; solid; and 28.09.” Group 15 contains “15; phosphorous; P; nonmetal; solid; and 30.97.” Group 16 contains “16; sulfur; S; nonmetal; solid; and 32.06.” Group 17 contains “17; chlorine; C l; nonmetal; gas; and 35.45.” Group 18 contains “18; argon; A r; nonmetal; gas; and 39.95.” Period 4, group 1 contains “19; potassium; K; metal; solid; and 39.10.” Group 2 contains “20; calcium; C a; metal; solid; and 40.08.” Group 3 contains “21; scandium; S c; metal; solid; and 44.96.” Group 4 contains “22; titanium; T i; metal; solid; and 47.87.” Group 5 contains “23; vanadium; V; metal; solid; and 50.94.” Group 6 contains “24; chromium; C r; metal; solid; and 52.00.” Group 7 contains “25; manganese; M n; metal; solid; and 54.94.” Group 8 contains “26; iron; F e; metal; solid; and 55.85.” Group 9 contains “27; cobalt; C o; metal; solid; and 58.93.” Group 10 contains “28; nickel; N i; metal; solid; and 58.69.” Group 11 contains “29; copper; C u; metal; solid; and 63.55.” Group 12 contains “30; zinc; Z n; metal; solid; and 65.38.” Group 13 contains “31; gallium; G a; metal; solid; and 69.72.” Group 14 contains “32; germanium; G e; metalloid; solid; and 72.63.” Group 15 contains “33; arsenic; A s; metalloid; solid; and 74.92.” Group 16 contains “34; selenium; S e; nonmetal; solid; and 78.97.” Group 17 contains “35; bromine; B r; nonmetal; liquid; and 79.90.” Group 18 contains “36; krypton; K r; nonmetal; gas; and 83.80.” Period 5, group 1 contains “37; rubidium; R b; metal; solid; and 85.47.” Group 2 contains “38; strontium; S r; metal; solid; and 87.62.” Group 3 contains “39; yttrium; Y; metal; solid; and 88.91.” Group 4 contains “40; zirconium; Z r; metal; solid; and 91.22.” Group 5 contains “41; niobium; N b; metal; solid; and 92.91.” Group 6 contains “42; molybdenum; M o; metal; solid; and 95.95.” Group 7 contains “43; technetium; T c; metal; solid; and 97.” Group 8 contains “44; ruthenium; R u; metal; solid; and 101.1.” Group 9 contains “45; rhodium; R h; metal; solid; and 102.9.” Group 10 contains “46; palladium; P d; metal; solid; and 106.4.” Group 11 contains “47; silver; A g; metal; solid; and 107.9.” Group 12 contains “48; cadmium; C d; metal; solid; and 112.4.” Group 13 contains “49; indium; I n; metal; solid; and 114.8.” Group 14 contains “50; tin; S n; metal; solid; and 118.7.” Group 15 contains “51; antimony; S b; metalloid; solid; and 121.8.” Group 16 contains “52; tellurium; T e; metalloid; solid; and 127.6.” Group 17 contains “53; iodine; I; nonmetal; solid; and 126.9.” Group 18 contains “54; xenon; X e; nonmetal; gas; and 131.3.” Period 6, group 1 contains “55; cesium; C s; metal; solid; and 132.9.” Group 2 contains “56; barium; B a; metal; solid; and 137.3.” Group 3 breaks the pattern. The box has a large arrow pointing to a row of elements below the table with atomic numbers ranging from 57-71. In sequential order by atomic number, the first box in this row contains “57; lanthanum; L a; metal; solid; and 138.9.” To its right, the next is “58; cerium; C e; metal; solid; and 140.1.” Next is “59; praseodymium; P r; metal; solid; and 140.9.” Next is “60; neodymium; N d; metal; solid; and 144.2.” Next is “61; promethium; P m; metal; solid; and 145.” Next is “62; samarium; S m; metal; solid; and 150.4.” Next is “63; europium; E u; metal; solid; and 152.0.” Next is “64; gadolinium; G d; metal; solid; and 157.3.” Next is “65; terbium; T b; metal; solid; and 158.9.” Next is “66; dysprosium; D y; metal; solid; and 162.5.” Next is “67; holmium; H o; metal; solid; and 164.9.” Next is “68; erbium; E r; metal; solid; and 167.3.” Next is “69; thulium; T m; metal; solid; and 168.9.” Next is “70; ytterbium; Y b; metal; solid; and 173.1.” The last in this special row is “71; lutetium; L u; metal; solid; and 175.0.” Continuing in period 6, group 4 contains “72; hafnium; H f; metal; solid; and 178.5.” Group 5 contains “73; tantalum; T a; metal; solid; and 180.9.” Group 6 contains “74; tungsten; W; metal; solid; and 183.8.” Group 7 contains “75; rhenium; R e; metal; solid; and 186.2.” Group 8 contains “76; osmium; O s; metal; solid; and 190.2.” Group 9 contains “77; iridium; I r; metal; solid; and 192.2.” Group 10 contains “78; platinum; P t; metal; solid; and 195.1.” Group 11 contains “79; gold; A u; metal; solid; and 197.0.” Group 12 contains “80; mercury; H g; metal; liquid; and 200.6.” Group 13 contains “81; thallium; T l; metal; solid; and 204.4.” Group 14 contains “82; lead; P b; metal; solid; and 207.2.” Group 15 contains “83; bismuth; B i; metal; solid; and 209.0.” Group 16 contains “84; polonium; P o; metal; solid; and 209.” Group 17 contains “85; astatine; A t; metalloid; solid; and 210.” Group 18 contains “86; radon; R n; nonmetal; gas; and 222.” Period 7, group 1 contains “87; francium; F r; metal; solid; and 223.” Group 2 contains “88; radium; R a; metal; solid; and 226.” Group 3 breaks the pattern much like what occurs in period 6. A large arrow points from the box in period 7, group 3 to a special row containing the elements with atomic numbers ranging from 89-103, just below the row which contains atomic numbers 57-71. In sequential order by atomic number, the first box in this row contains “89; actinium; A c; metal; solid; and 227.” To its right, the next is “90; thorium; T h; metal; solid; and 232.0.” Next is “91; protactinium; P a; metal; solid; and 231.0.” Next is “92; uranium; U; metal; solid; and 238.0.” Next is “93; neptunium; N p; metal; solid; and N p.” Next is “94; plutonium; P u; metal; solid; and 244.” Next is “95; americium; A m; metal; solid; and 243.” Next is “96; curium; C m; metal; solid; and 247.” Next is “97; berkelium; B k; metal; solid; and 247.” Next is “98; californium; C f; metal; solid; and 251.” Next is “99; einsteinium; E s; metal; solid; and 252.” Next is “100; fermium; F m; metal; solid; and 257.” Next is “101; mendelevium; M d; metal; solid; and 258.” Next is “102; nobelium; N o; metal; solid; and 259.” The last in this special row is “103; lawrencium; L r; metal; solid; and 262.” Continuing in period 7, group 4 contains “104; rutherfordium; R f; metal; solid; and 267.” Group 5 contains “105; dubnium; D b; metal; solid; and 270.” Group 6 contains “106; seaborgium; S g; metal; solid; and 271.” Group 7 contains “107; bohrium; B h; metal; solid; and 270.” Group 8 contains “108; hassium; H s; metal; solid; and 277.” Group 9 contains “109; meitnerium; M t; not

indicated; solid; and 276.” Group 10 contains “110; darmstadtium; D s; not indicated; solid; and 281.” Group 11 contains “111; roentgenium; R g; not indicated; solid; and 282.” Group 12 contains “112; copernicium; C n; metal; liquid; and 285.” Group 13 contains “113; ununtrium; U u t; not indicated; solid; and 285.” Group 14 contains “114; flerovium; F l; not indicated; solid; and 289.” Group 15 contains “115; ununpentium; U u p; not indicated; solid; and 288.” Group 16 contains “116; livermorium; L v; not indicated; solid; and 293.” Group 17 contains “117; ununseptium; U u s; not indicated; solid; and 294.” Group 18 contains “118; ununoctium; U u o; not indicated; solid; and 294.”

Many elements differ dramatically in their chemical and physical properties, but some elements are similar in their behaviors. For example, many elements appear shiny, are malleable (able to be deformed without breaking) and ductile (can be drawn into wires), and conduct heat and electricity well. Other elements are not shiny, malleable, or ductile, and are poor conductors of heat and electricity. We can sort the elements into large classes with common properties: metals (elements that are shiny, malleable, good conductors of heat and electricity—shaded yellow); nonmetals (elements that appear dull, poor conductors of heat and electricity—shaded green); and metalloids (elements that conduct heat and electricity moderately well, and possess some properties of metals and some properties of nonmetals—shaded purple).

The elements can also be classified into the main-group elements (or representative elements) in the columns labeled 1, 2, and 13–18; the transition metals in the columns labeled 3–12; and inner transition metals in the two rows at the bottom of the table (the top-row elements are called lanthanides and the bottom-row elements are actinides; Figure **2.3.3**). The elements can be subdivided further by more specific properties, such as the composition of the compounds they form. For example, the elements in group 1 (the first column) form compounds that consist of one atom of the element and one atom of hydrogen. These elements (except hydrogen) are known as alkali metals, and they all have similar chemical properties. The elements in group 2 (the second column) form compounds consisting of one atom of the element and two atoms of hydrogen: These are called alkaline earth metals, with similar properties among members of that group. Other groups with specific names are the pnictogens (group 15), chalcogens (group 16), halogens (group 17), and the noble gases (group 18, also known as inert gases). The groups can also be referred to by the first element of the group: For example, the chalcogens can be called the oxygen group or oxygen family. Hydrogen is a unique, nonmetallic element with properties similar to both group 1 and group 17 elements. For that reason, hydrogen may be shown at the top of both groups, or by itself.

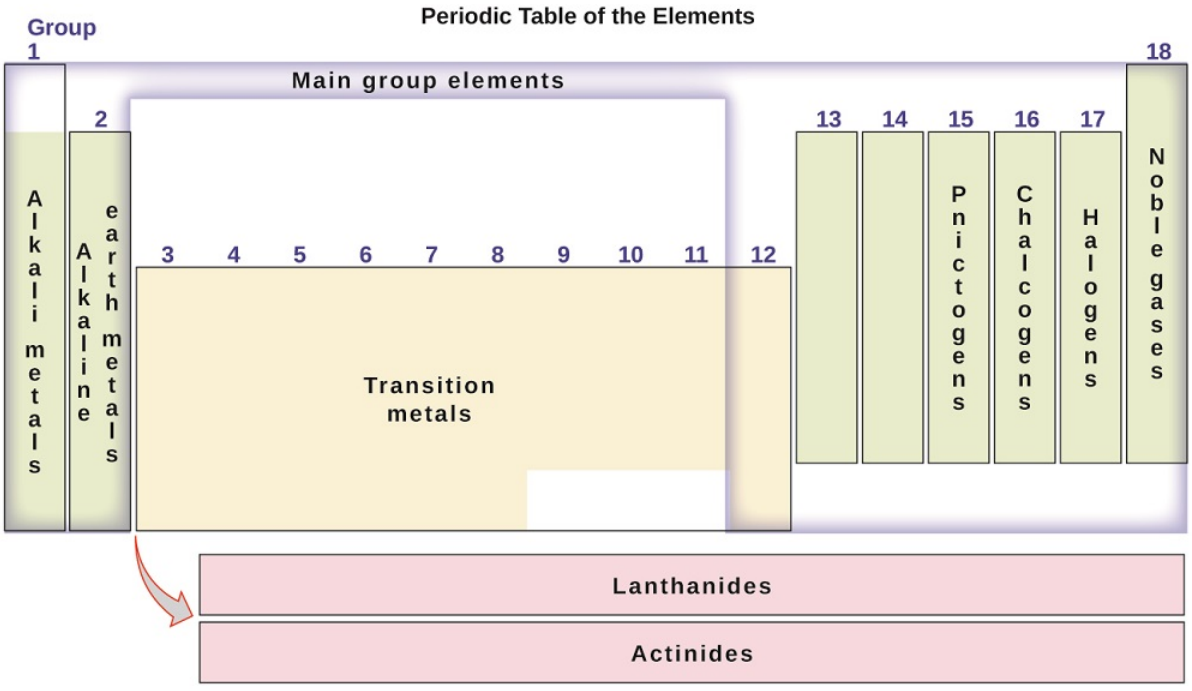

Figure **2.3.3**: The periodic table organizes elements with similar properties into groups.

This diagram combines the groups and periods of the periodic table based on their similar properties. Group 1 contains the alkali metals, group 2 contains the earth alkaline metals, group 15 contains the pnictogens, group 16 contains the chalcogens, group 17 contains the halogens and group 18 contains the noble gases. The main group elements consist of groups 1, 2, and 12 through 18. Therefore, most of the transition metals, which are contained in groups 3 through 11, are not main group elements. The lanthanides and actinides are called out at the bottom of the periodic table.

Example 2.3.1: Naming Groups of Elements

Atoms of each of the following elements are essential for life. Give the group name for the following elements:

a. chlorine
b. calcium
c. sodium
d. sulfur

Solution

The family names are as follows:

a. halogen
b. alkaline earth metal
c. alkali metal
d. chalcogen

Exercise 2.3.1

Give the group name for each of the following elements:

a. krypton
b. selenium
c. barium
d. lithium

Answer a

noble gas

Answer b

chalcogen

Answer c

alkaline earth metal

Answer d

alkali metal

In studying the periodic table, you might have noticed something about the atomic masses of some of the elements. Element 43 (technetium), element 61 (promethium), and most of the elements with atomic number 84 (polonium) and higher have their atomic mass given in square brackets. This is done for elements that consist entirely of unstable, radioactive isotopes (you will learn more about radioactivity in the nuclear chemistry chapter). An average atomic weight cannot be determined for these elements because their radioisotopes may vary significantly in relative abundance, depending on the source, or may not even exist in nature. The number in square brackets is the atomic mass number (and approximate atomic mass) of the most stable isotope of that element.

Summary

The discovery of the periodic recurrence of similar properties among the elements led to the formulation of the periodic table, in which the elements are arranged in order of increasing atomic number in rows known as periods and columns known as groups. Elements in the same group of the periodic table have similar chemical properties. Elements can be classified as metals, metalloids, and nonmetals, or as a main-group elements, transition metals, and inner transition metals. Groups are numbered 1–18 from left to right. The elements in group 1 are known as the alkali metals; those in group 2 are the alkaline earth metals; those in 15 are the pnictogens; those in 16 are the chalcogens; those in 17 are the halogens; and those in 18 are the noble gases.

Glossary

actinide
inner transition metal in the bottom of the bottom two rows of the periodic table

alkali metal
element in group 1

alkaline earth metal
element in group 2

chalcogen
element in group 16

group
vertical column of the periodic table

halogen
element in group 17

inert gas
(also, noble gas) element in group 18

inner transition metal
(also, lanthanide or actinide) element in the bottom two rows; if in the first row, also called lanthanide, or if in the second row, also called actinide

lanthanide
inner transition metal in the top of the bottom two rows of the periodic table

main-group element
(also, representative element) element in columns 1, 2, and 12–18

metal
element that is shiny, malleable, good conductor of heat and electricity

metalloid
element that conducts heat and electricity moderately well, and possesses some properties of metals and some properties of nonmetals

noble gas
(also, inert gas) element in group 18

nonmetal
element that appears dull, poor conductor of heat and electricity

period
(also, series) horizontal row of the periodic table

periodic law
properties of the elements are periodic function of their atomic numbers.

periodic table
table of the elements that places elements with similar chemical properties close together

pnictogen

element in group 15

representative element

(also, main-group element) element in columns 1, 2, and 12–18

transition metal

element in columns 3–11

series

(also, period) horizontal row of the period table

This page titled 2.3: The Periodic Table is shared under a CC BY license and was authored, remixed, and/or curated by OpenStax.

- **2.6: The Periodic Table** by OpenStax is licensed CC BY 4.0. Original source: https://openstax.org/details/books/chemistry-2e.

2.4: Molecular and Ionic Compounds

Skills to Develop

- Define ionic and molecular (covalent) compounds
- Predict the type of compound formed from elements based on their location within the periodic table
- Determine formulas for simple ionic compounds

In ordinary chemical reactions, the nucleus of each atom (and thus the identity of the element) remains unchanged. Electrons, however, can be added to atoms by transfer from other atoms, lost by transfer to other atoms, or shared with other atoms. The transfer and sharing of electrons among atoms govern the chemistry of the elements. During the formation of some compounds, atoms gain or lose electrons, and form electrically charged particles called ions (Figure **2.4.1**).

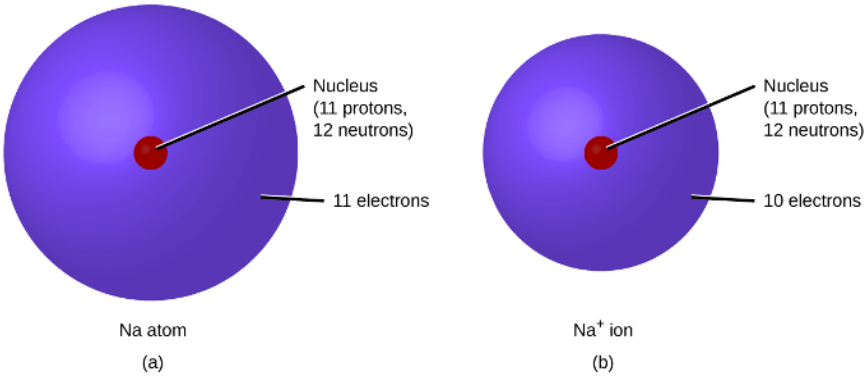

Figure **2.4.1**: (a) A sodium atom (Na) has equal numbers of protons and electrons (11) and is uncharged. (b) A sodium cation (Na^+) has lost an electron, so it has one more proton (11) than electrons (10), giving it an overall positive charge, signified by a superscripted plus sign.

You can use the periodic table to predict whether an atom will form an anion or a cation, and you can often predict the charge of the resulting ion. Atoms of many main-group metals lose enough electrons to leave them with the same number of electrons as an atom of the preceding noble gas. To illustrate, an atom of an alkali metal (group 1) loses one electron and forms a cation with a 1+ charge; an alkaline earth metal (group 2) loses two electrons and forms a cation with a 2+ charge, and so on. For example, a neutral calcium atom, with 20 protons and 20 electrons, readily loses two electrons. This results in a cation with 20 protons, 18 electrons, and a 2+ charge. It has the same number of electrons as atoms of the preceding noble gas, argon, and is symbolized Ca^{2+}. The name of a metal ion is the same as the name of the metal atom from which it forms, so Ca^{2+} is called a calcium ion.

When atoms of nonmetal elements form ions, they generally gain enough electrons to give them the same number of electrons as an atom of the next noble gas in the periodic table. Atoms of group 17 gain one electron and form anions with a 1− charge; atoms of group 16 gain two electrons and form ions with a 2− charge, and so on. For example, the neutral bromine atom, with 35 protons and 35 electrons, can gain one electron to provide it with 36 electrons. This results in an anion with 35 protons, 36 electrons, and a 1− charge. It has the same number of electrons as atoms of the next noble gas, krypton, and is symbolized Br^-. (A discussion of the theory supporting the favored status of noble gas electron numbers reflected in these predictive rules for ion formation is provided in a later chapter of this text.)

Note the usefulness of the periodic table in predicting likely ion formation and charge (Figure **2.4.2**). Moving from the far left to the right on the periodic table, main-group elements tend to form cations with a charge equal to the group number. That is, group 1 elements form 1+ ions; group 2 elements form 2+ ions, and so on. Moving from the far right to the left on the periodic table, elements often form anions with a negative charge equal to the number of groups moved left from the noble gases. For example, group 17 elements (one group left of the noble gases) form 1− ions; group 16 elements (two groups left) form 2− ions, and so on. This trend can be used as a guide in many cases, but its predictive value decreases when moving toward the center of the periodic table. In fact, transition metals and some other metals often exhibit variable charges that are not predictable by their location in the table. For example, copper can form ions with a 1+ or 2+ charge, and iron can form ions with a 2+ or 3+ charge.

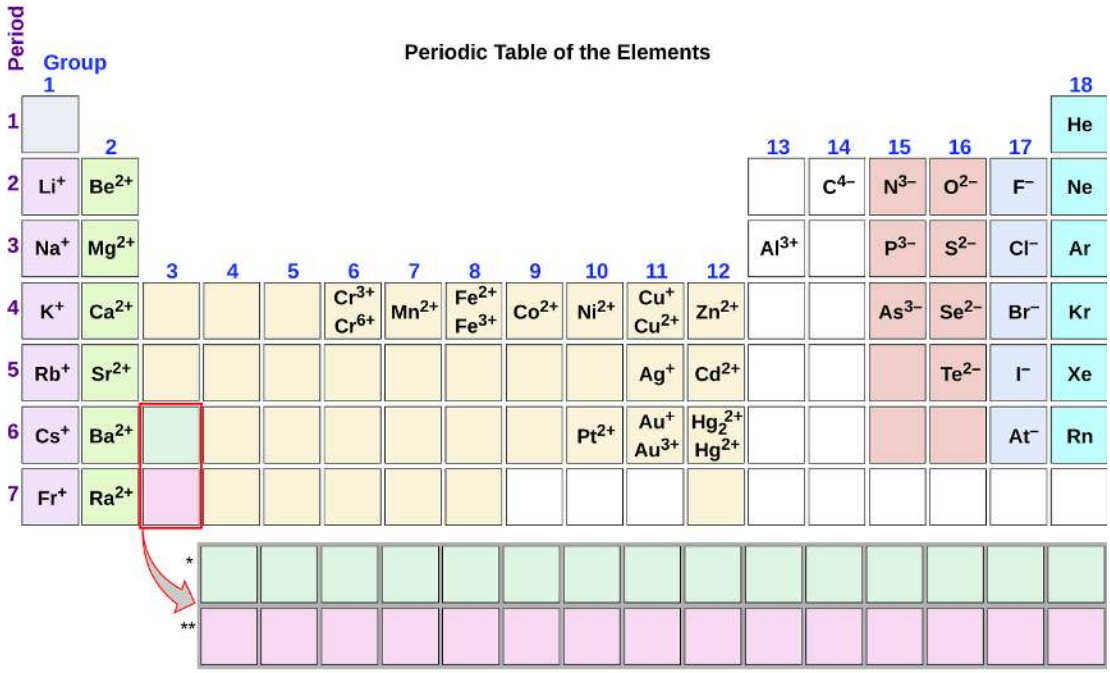

Figure **2.4.2**: Some elements exhibit a regular pattern of ionic charge when they form ions.

Example 2.4.1: Composition of Ions

An ion found in some compounds used as antiperspirants contains 13 protons and 10 electrons. What is its symbol?

Solution

Because the number of protons remains unchanged when an atom forms an ion, the atomic number of the element must be 13. Knowing this lets us use the periodic table to identify the element as Al (aluminum). The Al atom has lost three electrons and thus has three more positive charges (13) than it has electrons (10). This is the aluminum cation, Al^{3+}.

Exercise 2.4.1

Give the symbol and name for the ion with 34 protons and 36 electrons.

Answer

Se^{2-}, the selenide ion

Example 2.4.2: Formation of Ions

Magnesium and nitrogen react to form an ionic compound. Predict which forms an anion, which forms a cation, and the charges of each ion. Write the symbol for each ion and name them.

Solution

Magnesium's position in the periodic table (group 2) tells us that it is a metal. Metals form positive ions (cations). A magnesium atom must lose two electrons to have the same number electrons as an atom of the previous noble gas, neon. Thus, a magnesium atom will form a cation with two fewer electrons than protons and a charge of 2+. The symbol for the ion is Mg^{2+}, and it is called a magnesium ion.

Nitrogen's position in the periodic table (group 15) reveals that it is a nonmetal. Nonmetals form negative ions (anions). A nitrogen atom must gain three electrons to have the same number of electrons as an atom of the following noble gas, neon. Thus, a nitrogen atom will form an anion with three more electrons than protons and a charge of 3−. The symbol for the ion is N^{3-}, and it is called a nitride ion.

Exercise 2.4.2

Aluminum and carbon react to form an ionic compound. Predict which forms an anion, which forms a cation, and the charges of each ion. Write the symbol for each ion and name them.

Answer

Al will form a cation with a charge of 3+: Al^{3+}, an aluminum ion. Carbon will form an anion with a charge of 4−: C^{4-}, a carbide ion.

The ions that we have discussed so far are called monatomic ions, that is, they are ions formed from only one atom. We also find many polyatomic ions. These ions, which act as discrete units, are electrically charged molecules (a group of bonded atoms with an overall charge). Some of the more important polyatomic ions are listed in Table **2.4.1**. Oxyanions are polyatomic ions that contain one or more oxygen atoms. At this point in your study of chemistry, you should memorize the names, formulas, and charges of the most common polyatomic ions. Because you will use them repeatedly, they will soon become familiar.

Table 2.4.1: *Common Polyatomic Ions*

Name	Formula	Related Acid	Formula
ammonium	NH_4^+		
hydronium	H_3O^+		
oxide	O^{2-}		
peroxide	O_2^{2-}		
hydroxide	OH^-		
acetate	CH_3COO^-	acetic acid	CH_3COOH
cyanide	CN^-	hydrocyanic acid	HCN
azide	N_3^-	hydrazoic acid	HN_3
carbonate	CO_3^{2-}	carbonic acid	H_2CO_3
bicarbonate	HCO_3^-		
nitrate	NO_3^-	nitric acid	HNO_3
nitrite	NO_2^-	nitrous acid	HNO_2
sulfate	SO_4^{2-}	sulfuric acid	H_2SO_4
hydrogen sulfate	HSO_4^-		
sulfite	SO_3^{2-}	sulfurous acid	H_2SO_3
hydrogen sulfite	HSO_3^-		
phosphate	PO_4^{3-}	phosphoric acid	H_3PO_4
hydrogen phosphate	HPO_4^{2-}		
dihydrogen phosphate	$H_2PO_4^-$		
perchlorate	ClO_4^-	perchloric acid	$HClO_4$
chlorate	ClO_3^-	chloric acid	$HClO_3$
chlorite	ClO_2^-	chlorous acid	$HClO_2$
hypochlorite	ClO^-	hypochlorous acid	$HClO$
chromate	CrO_4^{2-}	chromic acid	H_2CrO_4
dichromate	$Cr_2O_7^{2-}$	dichromic acid	$H_2Cr_2O_7$
permanganate	MnO_4^-	permanganic acid	$HMnO_4$

Note that there is a system for naming some polyatomic ions; *-ate* and *-ite* are suffixes designating polyatomic ions containing more or fewer oxygen atoms. *Per-* (short for “hyper”) and *hypo-* (meaning “under”) are prefixes meaning more oxygen atoms than *-ate* and fewer oxygen atoms than *-ite*, respectively. For example, perchlorate is ClO_4^-, chlorate is ClO_3^-, chlorite is ClO_2^- and hypochlorite is ClO^-. Unfortunately, the number of oxygen atoms corresponding to a given suffix or prefix is not consistent; for example, nitrate is NO_3^- while sulfate is SO_4^{2-}. This will be covered in more detail in the next module on nomenclature.

The nature of the attractive forces that hold atoms or ions together within a compound is the basis for classifying chemical bonding. When electrons are transferred and ions form, ionic bonds result. Ionic bonds are electrostatic forces of attraction, that is, the attractive forces experienced between objects of opposite electrical charge (in this case, cations and anions). When electrons are “shared” and molecules form, covalent bonds result. Covalent bonds are the attractive forces between the positively charged nuclei

of the bonded atoms and one or more pairs of electrons that are located between the atoms. Compounds are classified as ionic or molecular (covalent) on the basis of the bonds present in them.

Ionic Compounds

When an element composed of atoms that readily lose electrons (a metal) reacts with an element composed of atoms that readily gain electrons (a nonmetal), a transfer of electrons usually occurs, producing ions. The compound formed by this transfer is stabilized by the electrostatic attractions (ionic bonds) between the ions of opposite charge present in the compound. For example, when each sodium atom in a sample of sodium metal (group 1) gives up one electron to form a sodium cation, Na^+, and each chlorine atom in a sample of chlorine gas (group 17) accepts one electron to form a chloride anion, Cl^-, the resulting compound, NaCl, is composed of sodium ions and chloride ions in the ratio of one Na^+ ion for each Cl^- ion. Similarly, each calcium atom (group 2) can give up two electrons and transfer one to each of two chlorine atoms to form $CaCl_2$, which is composed of Ca^{2+} and Cl^- ions in the ratio of one Ca^{2+} ion to two Cl^- ions.

A compound that contains ions and is held together by ionic bonds is called an ionic compound. The periodic table can help us recognize many of the compounds that are ionic: When a metal is combined with one or more nonmetals, the compound is usually ionic. This guideline works well for predicting ionic compound formation for most of the compounds typically encountered in an introductory chemistry course. However, it is not always true (for example, aluminum chloride, $AlCl_3$, is not ionic).

You can often recognize ionic compounds because of their properties. Ionic compounds are solids that typically melt at high temperatures and boil at even higher temperatures. For example, sodium chloride melts at 801 °C and boils at 1413 °C. (As a comparison, the molecular compound water melts at 0 °C and boils at 100 °C.) In solid form, an ionic compound is not electrically conductive because its ions are unable to flow (“electricity” is the flow of charged particles). When molten, however, it can conduct electricity because its ions are able to move freely through the liquid (Figure **2.4.3**).



Figure **2.4.3**: Sodium chloride melts at 801 °C and conducts electricity when molten. (credit: modification of work by Mark Blaser and Matt Evans)

In every ionic compound, the total number of positive charges of the cations equals the total number of negative charges of the anions. Thus, ionic compounds are electrically neutral overall, even though they contain positive and negative ions. We can use this observation to help us write the formula of an ionic compound. The formula of an ionic compound must have a ratio of ions such that the numbers of positive and negative charges are equal.

Example 2.4.3: Predicting the Formula of an Ionic Compound

The gemstone sapphire (Figure **2.4.4**) is mostly a compound of aluminum and oxygen that contains aluminum cations, Al^{3+}, and oxygen anions, O^{2-}. What is the formula of this compound?

Figure 2.4.4: Although pure aluminum oxide is colorless, trace amounts of iron and titanium give blue sapphire its characteristic color. (credit: modification of work by Stanislav Doronenko)

Solution Because the ionic compound must be electrically neutral, it must have the same number of positive and negative charges. Two aluminum ions, each with a charge of 3+, would give us six positive charges, and three oxide ions, each with a charge of 2−, would give us six negative charges. The formula would be Al_2O_3.

Exercise 2.4.3

Predict the formula of the ionic compound formed between the sodium cation, Na^+, and the sulfide anion, S^{2-}.

Answer

Na_2S

Many ionic compounds contain polyatomic ions (Table 2.4.1) as the cation, the anion, or both. As with simple ionic compounds, these compounds must also be electrically neutral, so their formulas can be predicted by treating the polyatomic ions as discrete units. We use parentheses in a formula to indicate a group of atoms that behave as a unit. For example, the formula for calcium phosphate, one of the minerals in our bones, is $Ca_3(PO_4)_2$. This formula indicates that there are three calcium ions (Ca^{2+}) for every two phosphate (PO_4^{3-}) groups. The PO_4^{3-} groups are discrete units, each consisting of one phosphorus atom and four oxygen atoms, and having an overall charge of 3−. The compound is electrically neutral, and its formula shows a total count of three Ca, two P, and eight O atoms.

Example 2.4.4: Predicting the Formula of a Compound with a Polyatomic Anion

Baking powder contains calcium dihydrogen phosphate, an ionic compound composed of the ions Ca^{2+} and $H_2PO_4^-$. What is the formula of this compound?

Solution

The positive and negative charges must balance, and this ionic compound must be electrically neutral. Thus, we must have two negative charges to balance the 2+ charge of the calcium ion. This requires a ratio of one Ca^{2+} ion to two $H_2PO_4^-$ ions. We designate this by enclosing the formula for the dihydrogen phosphate ion in parentheses and adding a subscript 2. The formula is $Ca(H_2PO_4)_2$.

Exercise 2.4.4

Predict the formula of the ionic compound formed between the lithium ion and the peroxide ion, O_2^{2-} (Hint: Use the periodic table to predict the sign and the charge on the lithium ion.)

Answer

Li_2O_2

Because an ionic compound is not made up of single, discrete molecules, it may not be properly symbolized using a *molecular* formula. Instead, ionic compounds must be symbolized by a formula indicating the *relative numbers* of its constituent ions. For compounds containing only monatomic ions (such as NaCl) and for many compounds containing polyatomic ions (such as $CaSO_4$), these formulas are just the empirical formulas introduced earlier in this chapter. However, the formulas for some ionic compounds containing polyatomic ions are not empirical formulas. For example, the ionic compound sodium oxalate is comprised of Na^+ and $C_2O_4^{2-}$ ions combined in a 2:1 ratio, and its formula is written as $Na_2C_2O_4$. The subscripts in this formula are not the smallest-

possible whole numbers, as each can be divided by 2 to yield the empirical formula, $NaCO_2$. This is not the accepted formula for sodium oxalate, however, as it does not accurately represent the compound's polyatomic anion, $C_2O_4^{2-}$.

Molecular Compounds

Many compounds do not contain ions but instead consist solely of discrete, neutral molecules. These molecular compounds (covalent compounds) result when atoms share, rather than transfer (gain or lose), electrons. Covalent bonding is an important and extensive concept in chemistry, and it will be treated in considerable detail in a later chapter of this text. We can often identify molecular compounds on the basis of their physical properties. Under normal conditions, molecular compounds often exist as gases, low-boiling liquids, and low-melting solids, although many important exceptions exist.

Whereas ionic compounds are usually formed when a metal and a nonmetal combine, covalent compounds are usually formed by a combination of nonmetals. Thus, the periodic table can help us recognize many of the compounds that are covalent. While we can use the positions of a compound's elements in the periodic table to predict whether it is ionic or covalent at this point in our study of chemistry, you should be aware that this is a very simplistic approach that does not account for a number of interesting exceptions. Shades of gray exist between ionic and molecular compounds, and you'll learn more about those later.

Example 2.4.5: Predicting the Type of Bonding in Compounds

Predict whether the following compounds are ionic or molecular:

a. KI, the compound used as a source of iodine in table salt
b. H_2O_2, the bleach and disinfectant hydrogen peroxide
c. $CHCl_3$, the anesthetic chloroform
d. Li_2CO_3, a source of lithium in antidepressants

Solution

a. Potassium (group 1) is a metal, and iodine (group 17) is a nonmetal; KI is predicted to be ionic.
b. Hydrogen (group 1) is a nonmetal, and oxygen (group 16) is a nonmetal; H_2O_2 is predicted to be molecular.
c. Carbon (group 14) is a nonmetal, hydrogen (group 1) is a nonmetal, and chlorine (group 17) is a nonmetal; $CHCl_3$ is predicted to be molecular.
d. Lithium (group 1) is a metal, and carbonate is a polyatomic ion; Li_2CO_3 is predicted to be ionic.

Exercise 2.4.5

Using the periodic table, predict whether the following compounds are ionic or covalent:

a. SO_2
b. CaF_2
c. N_2H_4
d. $Al_2(SO_4)_3$

Answer a

molecular

Answer b

ionic

Answer c

molecular

Answer d

ionic

Summary

Metals (particularly those in groups 1 and 2) tend to lose the number of electrons that would leave them with the same number of electrons as in the preceding noble gas in the periodic table. By this means, a positively charged ion is formed. Similarly, nonmetals (especially those in groups 16 and 17, and, to a lesser extent, those in Group 15) can gain the number of electrons needed to provide atoms with the same number of electrons as in the next noble gas in the periodic table. Thus, nonmetals tend to form negative ions. Positively charged ions are called cations, and negatively charged ions are called anions. Ions can be either monatomic (containing only one atom) or polyatomic (containing more than one atom).

Compounds that contain ions are called ionic compounds. Ionic compounds generally form from metals and nonmetals. Compounds that do not contain ions, but instead consist of atoms bonded tightly together in molecules (uncharged groups of atoms that behave as a single unit), are called covalent compounds. Covalent compounds usually form from two or more nonmetals.

Glossary

covalent bond
attractive force between the nuclei of a molecule's atoms and pairs of electrons between the atoms

covalent compound
(also, molecular compound) composed of molecules formed by atoms of two or more different elements

ionic bond
electrostatic forces of attraction between the oppositely charged ions of an ionic compound

ionic compound
compound composed of cations and anions combined in ratios, yielding an electrically neutral substance

molecular compound
(also, covalent compound) composed of molecules formed by atoms of two or more different elements

monatomic ion
ion composed of a single atom

polyatomic ion
ion composed of more than one atom

oxyanion
polyatomic anion composed of a central atom bonded to oxygen atoms

Contributors

- Paul Flowers (University of North Carolina - Pembroke), Klaus Theopold (University of Delaware) and Richard Langley (Stephen F. Austin State University) with contributing authors. Textbook content produced by OpenStax College is licensed under a Creative Commons Attribution License 4.0 license. Download for free at http://cnx.org/contents/85abf193-2bd...a7ac8df6@9.110).

This page titled 2.4: Molecular and Ionic Compounds is shared under a CC BY license and was authored, remixed, and/or curated by OpenStax.

2.5: Chemical Nomenclature

Learning Objectives

- Derive names for common types of inorganic compounds using a systematic approach.
- Describe how to name binary covalent compounds including acids and oxyacids.

Nomenclature, a collection of rules for naming things, is important in science and in many other situations. This module describes an approach that is used to name simple ionic and molecular compounds, such as NaCl, $CaCO_3$, and N_2O_4. The simplest of these are binary compounds, those containing only two elements, but we will also consider how to name ionic compounds containing polyatomic ions, and one specific, very important class of compounds known as acids (subsequent chapters in this text will focus on these compounds in great detail). We will limit our attention here to inorganic compounds, compounds that are composed principally of elements other than carbon, and will follow the nomenclature guidelines proposed by IUPAC. The rules for organic compounds, in which carbon is the principle element, will be treated in a later chapter on organic chemistry.

Ionic Compounds

To name an inorganic compound, we need to consider the answers to several questions. First, is the compound ionic or molecular? If the compound is ionic, does the metal form ions of only one type (fixed charge) or more than one type (variable charge)? Are the ions monatomic or polyatomic? If the compound is molecular, does it contain hydrogen? If so, does it also contain oxygen? From the answers we derive, we place the compound in an appropriate category and then name it accordingly. We will begin with the nomenclature rules for ionic compounds.

Compounds Containing Only Monatomic Ions

The name of a binary compound containing monatomic ions consists of the name of the cation (the name of the metal) followed by the name of the anion (the name of the nonmetallic element with its ending replaced by the suffix –*ide*). Some examples are given in Table **2.5.2**.

Table **2.5.1**: Names of Some Ionic Compounds

NaCl, sodium chloride	Na_2O, sodium oxide
KBr, potassium bromide	CdS, cadmium sulfide
CaI_2, calcium iodide	Mg_3N_2, magnesium nitride
CsF, cesium fluoride	Ca_3P_2, calcium phosphide
LiCl, lithium chloride	Al_4C_3, aluminum carbide

Compounds Containing Polyatomic Ions

Compounds containing polyatomic ions are named similarly to those containing only monatomic ions, except there is no need to change to an –*ide* ending, since the suffix is already present in the name of the anion. Examples are shown in Table **2.5.2**.

CL, ammonium chloride, C a S O subscript 4 calcium sulfate, and M g subscript 3 (P O subscript 4) subscript 2 magnesium phosphate." data-quail-id="54" data-mt-width="1246">

Table **2.5.2**: Names of Some Polyatomic Ionic Compounds

$KC_2H_3O_2$, potassium acetate	$(NH_4)Cl$, ammonium chloride
$NaHCO_3$, sodium bicarbonate	$CaSO_4$, calcium sulfate
$Al_2(CO_3)_3$, aluminum carbonate	$Mg_3(PO_4)_2$, magnesium phosphate

Ionic Compounds in Your Cabinets

Every day you encounter and use a large number of ionic compounds. Some of these compounds, where they are found, and what they are used for are listed in Table **2.5.3**. Look at the label or ingredients list on the various products that you use during the next few days, and see if you run into any of those in this table, or find other ionic compounds that you could now name or write as a formula.

Table **2.5.3**: Everyday Ionic Compounds

Ionic Compound	Name	Use
NaCl	sodium chloride	ordinary table salt
KI	potassium iodide	added to “iodized” salt for thyroid health
NaF	sodium fluoride	ingredient in toothpaste
$NaHCO_3$	sodium bicarbonate	baking soda; used in cooking (and in antacids)
Na_2CO_3	sodium carbonate	washing soda; used in cleaning agents
NaOCl	sodium hypochlorite	active ingredient in household bleach
$CaCO_3$	calcium carbonate	ingredient in antacids
$Mg(OH)_2$	magnesium hydroxide	ingredient in antacids
$Al(OH)_3$	aluminum hydroxide	ingredient in antacids
NaOH	sodium hydroxide	lye; used as drain cleaner
K_3PO_4	potassium phosphate	food additive (many purposes)
$MgSO_4$	magnesium sulfate	added to purified water
Na_2HPO_4	sodium hydrogen phosphate	anti-caking agent; used in powdered products
Na_2SO_3	sodium sulfite	preservative

Compounds Containing a Metal Ion with a Variable Charge

Most of the transition metals can form two or more cations with different charges. Compounds of these metals with nonmetals are named with the same method as compounds in the first category, except the charge of the metal ion is specified by a Roman numeral in parentheses after the name of the metal. The charge of the metal ion is determined from the formula of the compound and the charge of the anion. For example, consider binary ionic compounds of iron and chlorine. Iron typically exhibits a charge of either 2+ or 3+, and the two corresponding compound formulas are $FeCl_2$ and $FeCl_3$. The simplest name, “iron chloride,” will, in this case, be ambiguous, as it does not distinguish between these two compounds. In cases like this, the charge of the metal ion is included as a Roman numeral in parentheses immediately following the metal name. These two compounds are then unambiguously named iron(II) chloride and iron(III) chloride, respectively. Other examples are provided in Table **2.5.4**.

Table **2.5.4**: Names of Some Transition Metal Ionic Compounds

Transition Metal Ionic Compound	Name
$FeCl_3$	iron(III) chloride
Hg_2O	mercury(I) oxide
HgO	mercury(II) oxide
$Cu_3(PO_4)_2$	copper(II) phosphate

Out-of-date nomenclature used the suffixes *–ic* and *–ous* to designate metals with higher and lower charges, respectively: Iron(III) chloride, $FeCl_3$, was previously called ferric chloride, and iron(II) chloride, $FeCl_2$, was known as ferrous chloride. Though this naming convention has been largely abandoned by the scientific community, it remains in use by some segments of industry. For example, you may see the words *stannous fluoride* on a tube of toothpaste. This represents the formula SnF_2, which is more properly named tin(II) fluoride. The other fluoride of tin is SnF_4, which was previously called stannic fluoride but is now named tin(IV) fluoride.

Example 2.5.1: Naming Ionic Compounds

Name the following ionic compounds, which contain a metal that can have more than one ionic charge:

a. Fe_2S_3
b. CuSe
c. GaN
d. $CrCl_3$
e. $Ti_2(SO_4)_3$

Solution

The anions in these compounds have a fixed negative charge (S^{2-}, Se^{2-} , N^{3-}, Cl^-, and SO_4^{2-}), and the compounds must be neutral. Because the total number of positive charges in each compound must equal the total number of negative charges, the positive ions must be Fe^{3+}, Cu^{2+}, Ga^{3+}, Cr^{3+}, and Ti^{3+}. These charges are used in the names of the metal ions:

a. iron(III) sulfide
b. copper(II) selenide
c. gallium(III) nitride
d. chromium(III) chloride
e. titanium(III) sulfate

Exercise 2.5.1

Write the formulas of the following ionic compounds:

a. chromium(III) phosphide
b. mercury(II) sulfide
c. manganese(II) phosphate
d. copper(I) oxide
e. chromium(VI) fluoride

Answer a

CrP

Answer b

HgS

Answer c

$Mn_3(PO_4)_2$

Answer d

Cu_2O

Answer e

CrF_6

Erin Brokovich and Chromium Contamination

In the early 1990s, legal file clerk Erin Brockovich (Figure **2.5.2**) discovered a high rate of serious illnesses in the small town of Hinckley, California. Her investigation eventually linked the illnesses to groundwater contaminated by Cr(VI) used by Pacific Gas & Electric (PG&E) to fight corrosion in a nearby natural gas pipeline. As dramatized in the film *Erin Brokovich* (for which Julia Roberts won an Oscar), Erin and lawyer Edward Masry sued PG&E for contaminating the water near Hinckley in 1993. The settlement they won in 1996—$333 million—was the largest amount ever awarded for a direct-action lawsuit in the US at that time.

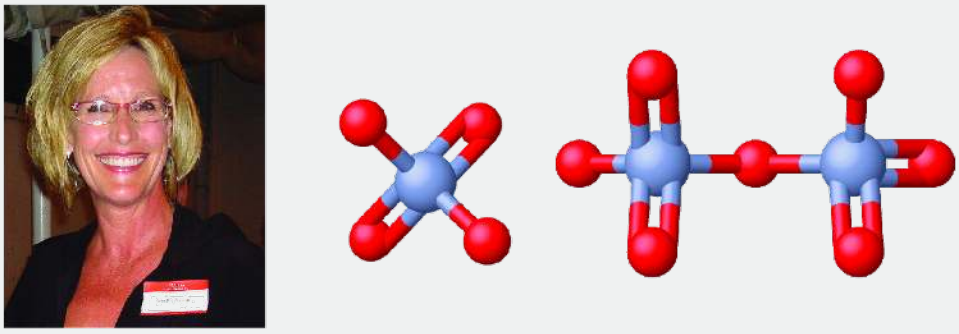

(a) (b)

Figure **2.5.2**: (a) Erin Brockovich found that Cr(VI), used by PG&E, had contaminated the Hinckley, California, water supply. (b) The Cr(VI) ion is often present in water as the polyatomic ions chromate, CrO_4^{2-} (left), and dichromate, $Cr_2O_7^{2-}$ (right).

Chromium compounds are widely used in industry, such as for chrome plating, in dye-making, as preservatives, and to prevent corrosion in cooling tower water, as occurred near Hinckley. In the environment, chromium exists primarily in either the Cr(III) or Cr(VI) forms. Cr(III), an ingredient of many vitamin and nutritional supplements, forms compounds that are not very soluble in water, and it has low toxicity. Cr(VI), on the other hand, is much more toxic and forms compounds that are reasonably soluble in water. Exposure to small amounts of Cr(VI) can lead to damage of the respiratory, gastrointestinal, and immune systems, as well as the kidneys, liver, blood, and skin.

Despite cleanup efforts, Cr(VI) groundwater contamination remains a problem in Hinckley and other locations across the globe. A 2010 study by the Environmental Working Group found that of 35 US cities tested, 31 had higher levels of Cr(VI) in their tap water than the public health goal of 0.02 parts per billion set by the California Environmental Protection Agency.

Molecular (Covalent) Compounds

The bonding characteristics of inorganic molecular compounds are different from ionic compounds, and they are named using a different system as well. The charges of cations and anions dictate their ratios in ionic compounds, so specifying the names of the ions provides sufficient information to determine chemical formulas. However, because covalent bonding allows for significant variation in the combination ratios of the atoms in a molecule, the names for molecular compounds must explicitly identify these ratios.

Compounds Composed of Two Elements

When two nonmetallic elements form a molecular compound, several combination ratios are often possible. For example, carbon and oxygen can form the compounds CO and CO_2. Since these are different substances with different properties, they cannot both have the same name (they cannot both be called carbon oxide). To deal with this situation, we use a naming method that is somewhat similar to that used for ionic compounds, but with added prefixes to specify the numbers of atoms of each element. The name of the more metallic element (the one farther to the left and/or bottom of the periodic table) is first, followed by the name of the more nonmetallic element (the one farther to the right and/or top) with its ending changed to the suffix *–ide*. The numbers of atoms of each element are designated by the Greek prefixes shown in Table **2.5.5**.

Table **2.5.5**: Nomenclature Prefixes

Number	Prefix		Number	Prefix
1 (sometimes omitted)	mono-		6	hexa-
2	di-		7	hepta-
3	tri-		8	octa-
4	tetra-		9	nona-
5	penta-		10	deca-

When only one atom of the first element is present, the prefix *mono-* is usually deleted from that part. Thus, **CO** is named carbon monoxide, and **CO_2** is called carbon dioxide. When two vowels are adjacent, the *a* in the Greek prefix is usually dropped. Some other examples are shown in Table **2.5.6**.

Table **2.5.6**: Names of Some Molecular Compounds Composed of Two Elements

Compound	Name		Compound	Name
SO_2	sulfur dioxide		BCl_3	boron trichloride
SO_3	sulfur trioxide		SF_6	sulfur hexafluoride
NO_2	nitrogen dioxide		PF_5	phosphorus pentafluoride
N_2O_4	dinitrogen tetroxide		P_4O_{10}	tetraphosphorus decaoxide
N_2O_5	dinitrogen pentoxide		IF_7	iodine heptafluoride

There are a few common names that you will encounter as you continue your study of chemistry. For example, although NO is often called nitric oxide, its proper name is nitrogen monoxide. Similarly, N_2O is known as nitrous oxide even though our rules would specify the name dinitrogen monoxide. (And H_2O is usually called water, not dihydrogen monoxide.) You should commit to memory the common names of compounds as you encounter them.

✔ Example 2.5.2: Naming Covalent Compounds

Name the following covalent compounds:

a. SF_6
b. N_2O_3
c. Cl_2O_7
d. P_4O_6

Solution

Because these compounds consist solely of nonmetals, we use prefixes to designate the number of atoms of each element:

a. sulfur hexafluoride
b. dinitrogen trioxide
c. dichlorine heptoxide
d. tetraphosphorus hexoxide

? Exercise 2.5.2

Write the formulas for the following compounds:

a. phosphorus pentachloride
b. dinitrogen monoxide

c. iodine heptafluoride
d. carbon tetrachloride

Answer a

PCl_5

Answer b

N_2O

Answer c

IF_7

Answer d

CCl_4

Binary Acids

Some compounds containing hydrogen are members of an important class of substances known as acids. The chemistry of these compounds is explored in more detail in later chapters of this text, but for now, it will suffice to note that many acids release hydrogen ions, H^+, when dissolved in water. To denote this distinct chemical property, a mixture of water with an acid is given a name derived from the compound's name. If the compound is a binary acid (comprised of hydrogen and one other nonmetallic element):

1. The word "hydrogen" is changed to the prefix *hydro-*
2. The other nonmetallic element name is modified by adding the suffix *-ic*
3. The word "acid" is added as a second word

For example, when the gas **HCl** (hydrogen chloride) is dissolved in water, the solution is called *hydrochloric acid*. Several other examples of this nomenclature are shown in Table **2.5.7**.

Table **2.5.7**: Names of Some Simple Acids

Name of Gas	Name of Acid
HF(*g*), hydrogen fluoride	HF(*aq*), hydrofluoric acid
HCl(*g*), hydrogen chloride	HCl(*aq*), hydrochloric acid
HBr(*g*), hydrogen bromide	HBr(*aq*), hydrobromic acid
HI(*g*), hydrogen iodide	HI(*aq*), hydroiodic acid
H_2S(*g*), hydrogen sulfide	H_2S(*aq*), hydrosulfuric acid

Oxyacids

Many compounds containing three or more elements (such as organic compounds or coordination compounds) are subject to specialized nomenclature rules that you will learn later. However, we will briefly discuss the important compounds known as oxyacids, compounds that contain hydrogen, oxygen, and at least one other element, and are bonded in such a way as to impart acidic properties to the compound (you will learn the details of this in a later chapter). Typical oxyacids consist of hydrogen combined with a polyatomic, oxygen-containing ion. To name oxyacids:

1. Omit "hydrogen"
2. Start with the root name of the anion
3. Replace *–ate* with *–ic*, or *–ite* with *–ous*
4. Add "acid"

For example, consider H_2CO_3 (which you might be tempted to call “hydrogen carbonate”). To name this correctly, “hydrogen” is omitted; the *–ate* of carbonate is replace with *–ic*; and acid is added—so its name is carbonic acid. Other examples are given in Table **2.5.8**. There are some exceptions to the general naming method (e.g., H_2SO_4 is called sulfuric acid, not sulfic acid, and H_2SO_3 is sulfurous, not sulfous, acid).

Table **2.5.8**: Names of Common Oxyacids

Formula	Anion Name	Acid Name
$HC_2H_3O_2$	acetate	acetic acid
HNO_3	nitrate	nitric acid
HNO_2	nitrite	nitrous acid
$HClO_4$	perchlorate	perchloric acid
H_2CO_3	carbonate	carbonic acid
H_2SO_4	sulfate	sulfuric acid
H_2SO_3	sulfite	sulfurous acid
H_3PO_4	phosphate	phosphoric acid

Summary

Chemists use nomenclature rules to clearly name compounds. Ionic and molecular compounds are named using somewhat-different methods. Binary ionic compounds typically consist of a metal and a nonmetal. The name of the metal is written first, followed by the name of the nonmetal with its ending changed to *–ide*. For example, K_2O is called potassium oxide. If the metal can form ions with different charges, a Roman numeral in parentheses follows the name of the metal to specify its charge. Thus, $FeCl_2$ is iron(II) chloride and $FeCl_3$ is iron(III) chloride. Some compounds contain polyatomic ions; the names of common polyatomic ions should be memorized. Molecular compounds can form compounds with different ratios of their elements, so prefixes are used to specify the numbers of atoms of each element in a molecule of the compound. Examples include SF_6, sulfur hexafluoride, and N_2O_4, dinitrogen tetroxide. Acids are an important class of compounds containing hydrogen and having special nomenclature rules. Binary acids are named using the prefix *hydro-*, changing the *–ide* suffix to *–ic*, and adding “acid;” HCl is hydrochloric acid. Oxyacids are named by changing the ending of the anion (*-ate* to *–ic*, and *-ite* to *-ous*) and adding “acid;” H_2CO_3 is carbonic acid.

Glossary

binary acid
: compound that contains hydrogen and one other element, bonded in a way that imparts acidic properties to the compound (ability to release H^+ ions when dissolved in water)

binary compound
: compound containing two different elements.

oxyacid
: compound that contains hydrogen, oxygen, and one other element, bonded in a way that imparts acidic properties to the compound (ability to release H^+ ions when dissolved in water)

nomenclature
: system of rules for naming objects of interest

This page titled 2.5: Chemical Nomenclature is shared under a CC BY license and was authored, remixed, and/or curated by OpenStax.

- **2.8: Chemical Nomenclature** by OpenStax is licensed CC BY 4.0. Original source: https://openstax.org/details/books/chemistry-2e.

https://chem.libretexts.org/@go/page/162450

CHAPTER OVERVIEW

3: Composition of Substances and Solutions

A general chemistry Libretexts Textmap organized around the textbook
General Chemistry -Atoms First
By OpenStax

I II III IV V VI VII VIII IX X XI XII XIII XIV XV XVI XVII XVIII XIX XX XXI ● **Homework**

Quantitative aspects of the composition of substances and mixtures are the subject of this chapter.

Topic hierarchy

3.1: Formula Mass and the Mole Concept

3.2: Determining Empirical and Molecular Formulas

3.3: Molarity

3.4: Other Units for Solution Concentrations

Contributors

- Paul Flowers (University of North Carolina - Pembroke), Klaus Theopold (University of Delaware) and Richard Langley (Stephen F. Austin State University) with contributing authors. Textbook content produced by OpenStax College is licensed under a Creative Commons Attribution License 4.0 license. Download for free at http://cnx.org/contents/85abf193-2bd...a7ac8df6@9.110).

This page titled 3: Composition of Substances and Solutions is shared under a CC BY license and was authored, remixed, and/or curated by OpenStax.

3.1: Formula Mass and the Mole Concept

Skills to Develop

- Calculate formula masses for covalent and ionic compounds
- Define the amount unit mole and the related quantity Avogadro's number
- Explain the relation between mass, moles, and numbers of atoms or molecules, and perform calculations deriving these quantities from one another

We can argue that modern chemical science began when scientists started exploring the quantitative as well as the qualitative aspects of chemistry. For example, Dalton's atomic theory was an attempt to explain the results of measurements that allowed him to calculate the relative masses of elements combined in various compounds. Understanding the relationship between the masses of atoms and the chemical formulas of compounds allows us to quantitatively describe the composition of substances.

Formula Mass

In an earlier chapter, we described the development of the atomic mass unit, the concept of average atomic masses, and the use of chemical formulas to represent the elemental makeup of substances. These ideas can be extended to calculate the formula mass of a substance by summing the average atomic masses of all the atoms represented in the substance's formula.

Formula Mass for Covalent Substances

For covalent substances, the formula represents the numbers and types of atoms composing a single molecule of the substance; therefore, the formula mass may be correctly referred to as a **molecular mass**. Consider chloroform ($CHCl_3$), a covalent compound once used as a surgical anesthetic and now primarily used in the production of tetrafluoroethylene, the building block for the "anti-stick" polymer, Teflon. The molecular formula of chloroform indicates that a single molecule contains one carbon atom, one hydrogen atom, and three chlorine atoms. The average molecular mass of a chloroform molecule is therefore equal to the sum of the average atomic masses of these atoms. Figure **3.1.1** outlines the calculations used to derive the molecular mass of chloroform, which is 119.37 amu.

Element	Quantity		Average atomic mass (amu)		Subtotal (amu)
C	1	×	12.01	=	12.01
H	1	×	1.008	=	1.008
Cl	3	×	35.45	=	106.35
				Molecular mass	119.37

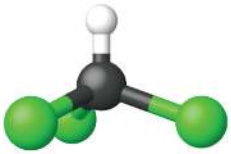

Figure **3.1.1**: The average mass of a chloroform molecule, $CHCl_3$, is 119.37 amu, which is the sum of the average atomic masses of each of its constituent atoms. The model shows the molecular structure of chloroform.

Likewise, the molecular mass of an aspirin molecule, $C_9H_8O_4$, is the sum of the atomic masses of nine carbon atoms, eight hydrogen atoms, and four oxygen atoms, which amounts to 180.15 amu (Figure **3.1.2**).

Element	Quantity		Average atomic mass (amu)		Subtotal (amu)
C	9	×	12.01	=	108.09
H	8	×	1.008	=	8.064
O	4	×	16.00	=	64.00
				Molecular mass	180.15

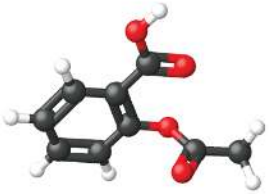

Figure* 3.1.2: The average mass of an aspirin molecule is 180.15 amu. The model shows the molecular structure of aspirin, $C_9H_8O_4$.*

Example 3.1.1: Computing Molecular Mass for a Covalent Compound

Ibuprofen, $C_{13}H_{18}O_2$, is a covalent compound and the active ingredient in several popular nonprescription pain medications, such as Advil and Motrin. What is the molecular mass (amu) for this compound?

Solution

Molecules of this compound are comprised of 13 carbon atoms, 18 hydrogen atoms, and 2 oxygen atoms. Following the approach described above, the average molecular mass for this compound is therefore:

Element	Quantity		Average atomic mass (amu)		Subtotal (amu)
C	13	×	12.01	=	156.13
H	18	×	1.008	=	18.114
O	2	×	16.00	=	32.00
				Molecular mass	206.27

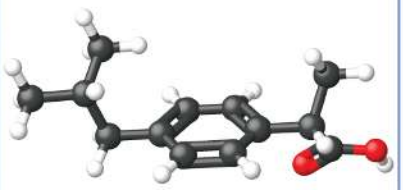

Exercise 3.1.1

Acetaminophen, $C_8H_9NO_2$, is a covalent compound and the active ingredient in several popular nonprescription pain medications, such as Tylenol. What is the molecular mass (amu) for this compound?

Answer

151.16 amu

Formula Mass for Ionic Compounds

Ionic compounds are composed of cations and anions combined in ratios to yield electrically neutral crystalline matter. The formula mass for an ionic compound is calculated in the same way as the formula mass for covalent compounds: by summing the average atomic masses of all the atoms in the compound's formula. Keep in mind, however, that the formula for an ionic compound does not represent the composition of a discrete molecule, so it may not correctly be referred to as the "molecular mass."

As an example, consider sodium chloride, NaCl, the chemical name for common table salt. Sodium chloride is an ionic compound composed of sodium cations, Na^+, and chloride anions, Cl^-, combined in a 1:1 ratio. The formula mass for this compound is computed as 58.44 amu (Figure **3.1.3**).

Element	Quantity		Average atomic mass (amu)		Subtotal
Na	1	×	22.99	=	22.99
Cl	1	×	35.45	=	35.45
				Formula mass	58.44

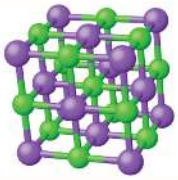

Figure **3.1.3**: Table salt, NaCl, contains an array of sodium and chloride ions combined in a 1:1 ratio. Its formula mass is 58.44 amu.

Note that the average masses of neutral sodium and chlorine atoms were used in this computation, rather than the masses for sodium cations and chlorine anions. This approach is perfectly acceptable when computing the formula mass of an ionic compound. Even though a sodium cation has a slightly smaller mass than a sodium atom (since it is missing an electron), this difference will be offset by the fact that a chloride anion is slightly more massive than a chloride atom (due to the extra electron). Moreover, the mass of an electron is negligibly small with respect to the mass of a typical atom. Even when calculating the mass of an isolated ion, the missing or additional electrons can generally be ignored, since their contribution to the overall mass is negligible, reflected only in the nonsignificant digits that will be lost when the computed mass is properly rounded. The few exceptions to this guideline are very light ions derived from elements with precisely known atomic masses.

Example 3.1.2: Computing Formula Mass for an Ionic Compound

Aluminum sulfate, $Al_2(SO_4)_3$, is an ionic compound that is used in the manufacture of paper and in various water purification processes. What is the formula mass (amu) of this compound?

Solution

The formula for this compound indicates it contains Al^{3+} and SO_4^{2-} ions combined in a 2:3 ratio. For purposes of computing a formula mass, it is helpful to rewrite the formula in the simpler format, $Al_2S_3O_{12}$. Following the approach outlined above, the formula mass for this compound is calculated as follows:

Element	Quantity		Average atomic mass (amu)		Subtotal (amu)
Al	2	×	26.98	=	53.96
S	3	×	32.06	=	96.18
O	12	×	16.00	=	192.00
				Molecular mass	342.14

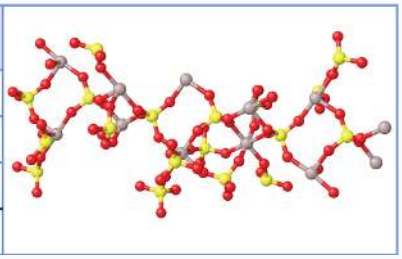

Exercise 3.1.2

Calcium phosphate, $Ca_3(PO_4)_2$, is an ionic compound and a common anti-caking agent added to food products. What is the formula mass (amu) of calcium phosphate?

Answer

310.18 amu

The Mole

The identity of a substance is defined not only by the types of atoms or ions it contains, but by the quantity of each type of atom or ion. For example, water, H_2O, and hydrogen peroxide, H_2O_2, are alike in that their respective molecules are composed of hydrogen and oxygen atoms. However, because a hydrogen peroxide molecule contains two oxygen atoms, as opposed to the water molecule, which has only one, the two substances exhibit very different properties. Today, we possess sophisticated instruments that allow the direct measurement of these defining microscopic traits; however, the same traits were originally derived from the measurement of macroscopic properties (the masses and volumes of bulk quantities of matter) using relatively simple tools (balances and volumetric glassware). This experimental approach required the introduction of a new unit for amount of substances, the *mole*, which remains indispensable in modern chemical science.

The mole is an amount unit similar to familiar units like pair, dozen, gross, etc. It provides a specific measure of *the number* of atoms or molecules in a bulk sample of matter. A mole is defined as the amount of substance containing the same number of discrete entities (such as atoms, molecules, and ions) as the number of atoms in a sample of pure ^{12}C weighing exactly 12 g. One Latin connotation for the word “mole” is “large mass” or “bulk,” which is consistent with its use as the name for this unit. The mole provides a link between an easily measured macroscopic property, bulk mass, and an extremely important fundamental property, number of atoms, molecules, and so forth.

The number of entities composing a mole has been experimentally determined to be $6.02214179 \times 10^{23}$, a fundamental constant named Avogadro’s number (N_A) or the Avogadro constant in honor of Italian scientist Amedeo Avogadro. This constant is properly reported with an explicit unit of “per mole,” a conveniently rounded version being $6.022 \times 10^{23}/\text{mol}$.

Consistent with its definition as an amount unit, 1 mole of any element contains the same number of atoms as 1 mole of any other element. The masses of 1 mole of different elements, however, are different, since the masses of the individual atoms are drastically different. The molar mass of an element (or compound) is the mass in grams of 1 mole of that substance, a property expressed in units of grams per mole (g/mol) (Figure **3.1.4**).



Figure **3.1.4**: Each sample contains $\mathbf{6.022 \times 10^{23}}$ atoms —1.00 mol of atoms. From left to right (top row): 65.4 g zinc, 12.0 g carbon, 24.3 g magnesium, and 63.5 g copper. From left to right (bottom row): 32.1 g sulfur, 28.1 g silicon, 207 g lead, and 118.7 g tin. (credit: modification of work by Mark Ott).

Because the definitions of both the mole and the atomic mass unit are based on the same reference substance, ^{12}C, the molar mass of any substance is numerically equivalent to its atomic or formula weight in amu. Per the amu definition, a single ^{12}C atom weighs 12 amu (its atomic mass is 12 amu). According to the definition of the mole, 12 g of ^{12}C contains 1 mole of ^{12}C atoms (its molar mass is 12 g/mol). This relationship holds for all elements, since their atomic masses are measured relative to that of the amu-reference substance, ^{12}C. Extending this principle, the molar mass of a compound in grams is likewise numerically equivalent to its formula mass in amu (Figure **3.1.5**).

Figure **3.1.5**: Each sample contains $\mathbf{6.022 \times 10^{23}}$ molecules or formula units—1.00 mol of the compound or element. Clock-wise from the upper left: 130.2 g of $C_8H_{17}OH$ (1-octanol, formula mass 130.2 amu), 454.4 g of HgI_2 (mercury(II) iodide, formula mass 454.4 amu), 32.0 g of CH_3OH (methanol, formula mass 32.0 amu) and 256.5 g of S_8 (sulfur, formula mass 256.5 amu). (credit: Sahar Atwa).

***Table* 3.1.1:** *Mass of one mole of elements*

Element	Average Atomic Mass (amu)	Molar Mass (g/mol)	Atoms/Mole
C	12.01	12.01	$\mathbf{6.022 \times 10^{23}}$
H	1.008	1.008	$\mathbf{6.022 \times 10^{23}}$
O	16.00	16.00	$\mathbf{6.022 \times 10^{23}}$
Na	22.99	22.99	$\mathbf{6.022 \times 10^{23}}$
Cl	33.45	35.45	$\mathbf{6.022 \times 10^{23}}$

While atomic mass and molar mass are numerically equivalent, keep in mind that they are vastly different in terms of scale, as represented by the vast difference in the magnitudes of their respective units (amu versus g). To appreciate the enormity of the

mole, consider a small drop of water after a rainfall. Although this represents just a tiny fraction of 1 mole of water (~18 g), it contains more water molecules than can be clearly imagined. If the molecules were distributed equally among the roughly seven billion people on earth, each person would receive more than 100 billion molecules.

The relationships between formula mass, the mole, and Avogadro's number can be applied to compute various quantities that describe the composition of substances and compounds. For example, if we know the mass and chemical composition of a substance, we can determine the number of moles and calculate number of atoms or molecules in the sample. Likewise, if we know the number of moles of a substance, we can derive the number of atoms or molecules and calculate the substance's mass.

Example 3.1.3: Deriving Moles from Grams for an Element

According to nutritional guidelines from the US Department of Agriculture, the estimated average requirement for dietary potassium is 4.7 g. What is the estimated average requirement of potassium in moles?

Solution

The mass of K is provided, and the corresponding amount of K in moles is requested. Referring to the periodic table, the atomic mass of K is 39.10 amu, and so its molar mass is 39.10 g/mol. The given mass of K (4.7 g) is a bit more than one-tenth the molar mass (39.10 g), so a reasonable "ballpark" estimate of the number of moles would be slightly greater than 0.1 mol.

The molar amount of a substance may be calculated by dividing its mass (g) by its molar mass (g/mol):

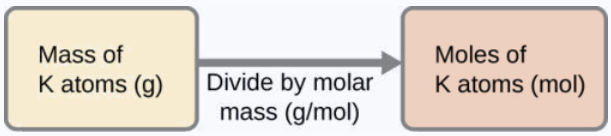

The factor-label method supports this mathematical approach since the unit "g" cancels and the answer has units of "mol:"

$$4.7\ \cancel{g}\text{K}\left(\frac{\text{mol K}}{39.10\ \cancel{g}}\right) = 0.12\ \text{mol K} onumber \tag{3.1.1}$$

The calculated magnitude (0.12 mol K) is consistent with our ballpark expectation, since it is a bit greater than 0.1 mol.

Exercise 3.1.3: Beryllium

Beryllium is a light metal used to fabricate transparent X-ray windows for medical imaging instruments. How many moles of Be are in a thin-foil window weighing 3.24 g?

Answer

0.360 mol

Example 3.1.4: Deriving Grams from Moles for an Element

A liter of air contains 9.2×10^{-4} mol argon. What is the mass of Ar in a liter of air?

Solution

The molar amount of Ar is provided and must be used to derive the corresponding mass in grams. Since the amount of Ar is less than 1 mole, the mass will be less than the mass of 1 mole of Ar, approximately 40 g. The molar amount in question is approximately one-one thousandth ($\sim 10^{-3}$) of a mole, and so the corresponding mass should be roughly one-one thousandth of the molar mass (~0.04 g):

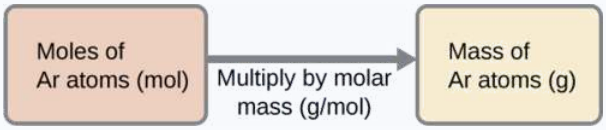

In this case, logic dictates (and the factor-label method supports) multiplying the provided amount (mol) by the molar mass (g/mol):

$$9.2 \times 10^{-4} \cancel{\text{mol Ar}} \left(\frac{39.95 \text{ g}}{\cancel{\text{mol Ar}}} \right) = 0.037 \text{ g Ar} onumber \tag{3.1.2}$$

The result is in agreement with our expectations, around 0.04 g Ar.

Exercise 3.1.4

What is the mass of 2.561 mol of gold?

Answer

504.4 g

Example 3.1.6: Deriving Number of Atoms from Mass for an Element

Copper is commonly used to fabricate electrical wire (Figure **3.1.6**). How many copper atoms are in 5.00 g of copper wire?

Figure **3.1.6**: Copper wire is composed of many, many atoms of Cu. (credit: Emilian Robert Vicol)

Solution

The number of Cu atoms in the wire may be conveniently derived from its mass by a two-step computation: first calculating the molar amount of Cu, and then using Avogadro's number (N_A) to convert this molar amount to number of Cu atoms:

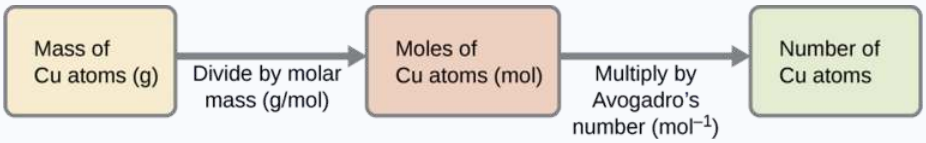

Considering that the provided sample mass (5.00 g) is a little less than one-tenth the mass of 1 mole of Cu (~64 g), a reasonable estimate for the number of atoms in the sample would be on the order of one-tenth N_A, or approximately 10^{22} Cu atoms. Carrying out the two-step computation yields:

$$5.00 \cancel{\text{ g}} \text{ Cu} \left(\frac{\cancel{\text{mol}} \text{ Cu}}{63.55 \cancel{\text{ g}}} \right) \left(\frac{6.022 \times 10^{23} \text{ atoms}}{\cancel{\text{mol}}} \right) = 4.74 \times 10^{22} \text{ atoms of copper} \tag{3.1.3}$$

The factor-label method yields the desired cancellation of units, and the computed result is on the order of 10^{22} as expected.

Exercise 3.1.6

A prospector panning for gold in a river collects 15.00 g of pure gold. How many Au atoms are in this quantity of gold?

Answer

4.586×10^{22} Au atoms

Example 3.1.7: Deriving Moles from Grams for a Compound

Our bodies synthesize protein from amino acids. One of these amino acids is glycine, which has the molecular formula $C_2H_5O_2N$. How many moles of glycine molecules are contained in 28.35 g of glycine?

Solution

We can derive the number of moles of a compound from its mass following the same procedure we used for an element in Example **3.1.6**:

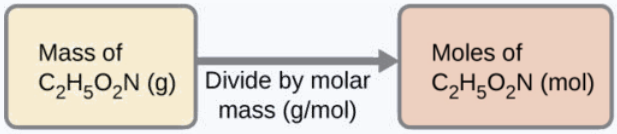

The molar mass of glycine is required for this calculation, and it is computed in the same fashion as its molecular mass. One mole of glycine, $C_2H_5O_2N$, contains 2 moles of carbon, 5 moles of hydrogen, 2 moles of oxygen, and 1 mole of nitrogen:

Element	Quantity (mol element/ mol compound)		Molar mass (g/mol element)		Subtotal (g/mol compound)
C	2	×	12.01	=	24.02
H	5	×	1.008	=	5.040
O	2	×	16.00	=	32.00
N	1	×	14.007	=	14.007
Molecular mass (g/mol compound)					75.07

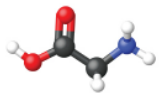

The provided mass of glycine (~28 g) is a bit more than one-third the molar mass (~75 g/mol), so we would expect the computed result to be a bit greater than one-third of a mole (~0.33 mol). Dividing the compound's mass by its molar mass yields:

$$28.35 \cancel{\text{ g}} \text{ glycine} \left(\frac{\text{mol glycine}}{75.07 \cancel{\text{ g}}} \right) = 0.378 \text{ mol glycine} \textit{onumber} \tag{3.1.4}$$

This result is consistent with our rough estimate.

Exercise 3.1.7

How many moles of sucrose, $C_{12}H_{22}O_{11}$, are in a 25-g sample of sucrose?

Answer

0.073 mol

Example 3.1.8: Deriving Grams from Moles for a Compound

Vitamin C is a covalent compound with the molecular formula $C_6H_8O_6$. The recommended daily dietary allowance of vitamin C for children aged 4–8 years is 1.42×10^{-4} mol. What is the mass of this allowance in grams?

Solution

As for elements, the mass of a compound can be derived from its molar amount as shown:

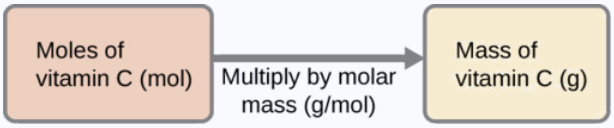

The molar mass for this compound is computed to be 176.124 g/mol. The given number of moles is a very small fraction of a mole (~10^{-4} or one-ten thousandth); therefore, we would expect the corresponding mass to be about one-ten thousandth of the molar mass (~0.02 g). Performing the calculation, we get:

$$1.42 \times 10^{-4} \cancel{\text{mol}}\ \text{vitamin C} \left(\frac{176.124\ \text{g}}{\cancel{\text{mol}}\ \text{vitamin C}} \right) = 0.0250\ \text{g vitamin C} onumber \tag{3.1.5}$$

This is consistent with the anticipated result.

Exercise 3.1.8

What is the mass of 0.443 mol of hydrazine, N_2H_4?

Answer

14.2 g

Example 3.1.9: Deriving the Number of Molecules from the Compound Mass

A packet of an artificial sweetener contains 40.0 mg of saccharin ($C_7H_5NO_3S$), which has the structural formula:

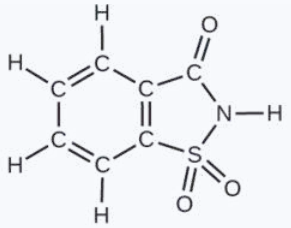

Given that saccharin has a molar mass of 183.18 g/mol, how many saccharin molecules are in a 40.0-mg (0.0400-g) sample of saccharin? How many carbon atoms are in the same sample?

Solution

The number of molecules in a given mass of compound is computed by first deriving the number of moles, as demonstrated in Example 3.1.8, and then multiplying by Avogadro's number:

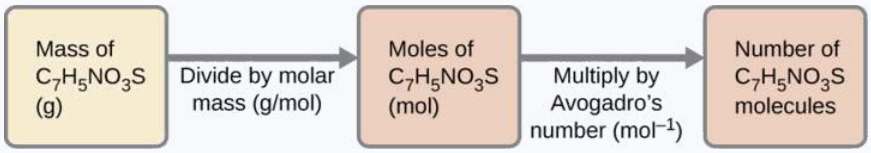

Using the provided mass and molar mass for saccharin yields:

$$0.0400\ \cancel{\text{g}}\ \text{C}_7\text{H}_5\text{NO}_3\text{S} \left(\frac{\cancel{\text{mol}}\ \text{C}_7\text{H}_5\text{NO}_3\text{S}}{183.18\ \cancel{\text{g}}\ \text{C}_7\text{H}_5\text{NO}_3\text{S}} \right) \left(\frac{6.022 \times 10^{23}\ \text{C}_7\text{H}_5\text{NO}_3\text{S molecules}}{1\ \cancel{\text{mol}}\ \text{C}_7\text{H}_5\text{NO}_3\text{S}} \right) = 1.31 \times 10^{20}\ \text{C}_7\text{H}_5\text{NO}_3\text{S molecules} \tag{3.1.6}$$

The compound's formula shows that each molecule contains seven carbon atoms, and so the number of C atoms in the provided sample is:

$$1.31 \times 10^{20}\ \text{C}_7\text{H}_5\text{NO}_3\text{S molecules} \left(\frac{7\ \text{C atoms}}{1\ \text{C}_7\text{H}_5\text{NO}_3\text{S molecule}} \right) = 9.20 \times 10^{21}\ \text{C atoms} onumber \tag{3.1.7}$$

Exercise 3.1.9

How many C_4H_{10} molecules are contained in 9.213 g of this compound? How many hydrogen atoms?

Answer

- 9.545×10^{22} molecules C_4H_{10}

- 9.545×10^{23} atoms H

Summary

The formula mass of a substance is the sum of the average atomic masses of each atom represented in the chemical formula and is expressed in atomic mass units. The formula mass of a covalent compound is also called the molecular mass. A convenient amount unit for expressing very large numbers of atoms or molecules is the mole. Experimental measurements have determined the number of entities composing 1 mole of substance to be 6.022×10^{23}, a quantity called Avogadro's number. The mass in grams of 1 mole of substance is its molar mass. Due to the use of the same reference substance in defining the atomic mass unit and the mole, the formula mass (amu) and molar mass (g/mol) for any substance are numerically equivalent (for example, one H_2O molecule weighs approximately18 amu and 1 mole of H_2O molecules weighs approximately 18 g).

Footnotes

1. 1 Omiatek, Donna M., Amanda J. Bressler, Ann-Sofie Cans, Anne M. Andrews, Michael L. Heien, and Andrew G. Ewing. "The Real Catecholamine Content of Secretory Vesicles in the CNS Revealed by Electrochemical Cytometry." *Scientific Report* 3 (2013): 1447, accessed January 14, 2015, doi:10.1038/srep01447.

Glossary

Avogadro's number (N_A)
: experimentally determined value of the number of entities comprising 1 mole of substance, equal to 6.022×10^{23} mol^{-1}

formula mass
: sum of the average masses for all atoms represented in a chemical formula; for covalent compounds, this is also the molecular mass

mole
: amount of substance containing the same number of atoms, molecules, ions, or other entities as the number of atoms in exactly 12 grams of ^{12}C

molar mass
: mass in grams of 1 mole of a substance

Contributors

- Paul Flowers (University of North Carolina - Pembroke), Klaus Theopold (University of Delaware) and Richard Langley (Stephen F. Austin State University) with contributing authors. Textbook content produced by OpenStax College is licensed under a Creative Commons Attribution License 4.0 license. Download for free at http://cnx.org/contents/85abf193-2bd...a7ac8df6@9.110).

This page titled 3.1: Formula Mass and the Mole Concept is shared under a CC BY license and was authored, remixed, and/or curated by OpenStax.

3.2: Determining Empirical and Molecular Formulas

Learning Objectives

- Compute the percent composition of a compound
- Determine the empirical formula of a compound
- Determine the molecular formula of a compound

In the previous section, we discussed the relationship between the bulk mass of a substance and the number of atoms or molecules it contains (moles). Given the chemical formula of the substance, we were able to determine the amount of the substance (moles) from its mass, and vice versa. But what if the chemical formula of a substance is unknown? In this section, we will explore how to apply these very same principles in order to derive the chemical formulas of unknown substances from experimental mass measurements.

Percent Composition

The elemental makeup of a compound defines its chemical identity, and chemical formulas are the most succinct way of representing this elemental makeup. When a compound's formula is unknown, measuring the mass of each of its constituent elements is often the first step in the process of determining the formula experimentally. The results of these measurements permit the calculation of the compound's percent composition, defined as the percentage by mass of each element in the compound. For example, consider a gaseous compound composed solely of carbon and hydrogen. The percent composition of this compound could be represented as follows:

$$\%\mathrm{H} = \frac{\text{mass H}}{\text{mass compound}} \times 100\%$$

$$\%\mathrm{C} = \frac{\text{mass C}}{\text{mass compound}} \times 100\%$$

If analysis of a 10.0-g sample of this gas showed it to contain 2.5 g H and 7.5 g C, the percent composition would be calculated to be 25% H and 75% C:

$$\%\mathrm{H} = \frac{2.5\ \text{g H}}{10.0\ \text{g compound}} \times 100\% = 25\%$$

$$\%\mathrm{C} = \frac{7.5\ \text{g C}}{10.0\ \text{g compound}} \times 100\% = 75\%$$

Example 3.2.1: Calculation of Percent Composition

Analysis of a 12.04-g sample of a liquid compound composed of carbon, hydrogen, and nitrogen showed it to contain 7.34 g C, 1.85 g H, and 2.85 g N. What is the percent composition of this compound?

Solution

To calculate percent composition, we divide the experimentally derived mass of each element by the overall mass of the compound, and then convert to a percentage:

$$\%\mathrm{C} = \frac{7.34\ \text{g C}}{12.04\ \text{g compound}} \times 100\% = 61.0\%$$

$$\%\mathrm{H} = \frac{1.85\ \text{g H}}{12.04\ \text{g compound}} \times 100\% = 15.4\%$$

$$\%\mathrm{N} = \frac{2.85\ \text{g N}}{12.04\ \text{g compound}} \times 100\% = 23.7\%$$

The analysis results indicate that the compound is 61.0% C, 15.4% H, and 23.7% N by mass.

? Exercise 3.2.1

A 24.81-g sample of a gaseous compound containing only carbon, oxygen, and chlorine is determined to contain 3.01 g C, 4.00 g O, and 17.81 g Cl. What is this compound's percent composition?

Answer

12.1% C, 16.1% O, 71.8% Cl

Determining Percent Composition from Formula Mass

Percent composition is also useful for evaluating the relative abundance of a given element in different compounds of known formulas. As one example, consider the common nitrogen-containing fertilizers ammonia (NH_3), ammonium nitrate (NH_4NO_3), and urea (CH_4N_2O). The element nitrogen is the active ingredient for agricultural purposes, so the mass percentage of nitrogen in the compound is a practical and economic concern for consumers choosing among these fertilizers. For these sorts of applications, the percent composition of a compound is easily derived from its formula mass and the atomic masses of its constituent elements. A molecule of NH_3 contains one N atom weighing 14.01 amu and three H atoms weighing a total of (3 × 1.008 amu) = 3.024 amu. The formula mass of ammonia is therefore (14.01 amu + 3.024 amu) = 17.03 amu, and its percent composition is:

$$\%\mathrm{N} = \frac{14.01\ \text{amu N}}{17.03\ \text{amu NH}_3} \times 100\% = 82.27\%$$

$$\%\mathrm{H} = \frac{3.024\ \text{amu N}}{17.03\ \text{amu NH}_3} \times 100\% = 17.76\%$$

This same approach may be taken considering a pair of molecules, a dozen molecules, or a mole of molecules, etc. The latter amount is most convenient and would simply involve the use of molar masses instead of atomic and formula masses, as demonstrated Example **3.2.2**. As long as we know the chemical formula of the substance in question, we can easily derive percent composition from the formula mass or molar mass.

✓ Example 3.2.2: Determining Percent Composition from a Molecular Formula

Aspirin is a compound with the molecular formula $C_9H_8O_4$. What is its percent composition?

Solution

To calculate the percent composition, we need to know the masses of C, H, and O in a known mass of $C_9H_8O_4$. It is convenient to consider 1 mol of $C_9H_8O_4$ and use its molar mass (180.159 g/mole, determined from the chemical formula) to calculate the percentages of each of its elements:

$$\%\mathrm{C} = \frac{9\ \text{mol C} \times \text{molar mass C}}{\text{molar mass } C_9H_{18}O_4} \times 100$$

$$= \frac{9 \times 12.01\ \text{g/mol}}{180.159\ \text{g/mol}} \times 100 = \frac{108.09\ \text{g/mol}}{180.159\ \text{g/mol}} \times 100$$

$$\%\mathrm{C} = 60.00\,\%\,\mathrm{C}$$

$$\%\mathrm{H} = \frac{8\ \text{mol H} \times \text{molar mass H}}{\text{molar mass } C_9H_{18}O_4} \times 100$$

$$= \frac{8 \times 1.008\ \text{g/mol}}{180.159\ \text{g/mol}} \times 100 = \frac{8.064\ \text{g/mol}}{180.159\ \text{g/mol}} \times 100$$

$$\%\mathrm{H} = 4.476\,\%\,\mathrm{H}$$

$$\%\mathrm{O} = \frac{4\ \text{mol O} \times \text{molar mass O}}{\text{molar mass } C_9H_{18}O_4} \times 100$$

$$= \frac{4 \times 16.00\ \text{g/mol}}{180.159\ \text{g/mol}} \times 100 = \frac{64.00\ \text{g/mol}}{180.159\ \text{g/mol}} \times 100$$

$$\%\mathrm{O} = 35.52\%$$

Note that these percentages sum to equal 100.00% when appropriately rounded.

? Exercise 3.2.2

To three significant digits, what is the mass percentage of iron in the compound Fe_2O_3?

Answer

69.9% Fe

Determination of Empirical Formulas

As previously mentioned, the most common approach to determining a compound's chemical formula is to first measure the masses of its constituent elements. However, we must keep in mind that chemical formulas represent the relative *numbers*, not masses, of atoms in the substance. Therefore, any experimentally derived data involving mass must be used to derive the corresponding numbers of atoms in the compound. To accomplish this, we can use molar masses to convert the mass of each element to a number of moles. We then consider the moles of each element relative to each other, converting these numbers into a whole-number ratio that can be used to derive the empirical formula of the substance. Consider a sample of compound determined to contain 1.71 g C and 0.287 g H. The corresponding numbers of atoms (in moles) are:

$$1.71\ \text{g C} \times \frac{1\ \text{mol C}}{12.01\ \text{g C}} = 0.142\ \text{mol C}$$

$$0.287\ \text{g H} \times \frac{1\ \text{mol H}}{1.008\ \text{g H}} = 0.284\ \text{mol H}$$

Thus, we can accurately represent this compound with the formula $C_{0.142}H_{0.284}$. Of course, per accepted convention, formulas contain whole-number subscripts, which can be achieved by dividing each subscript by the smaller subscript:

$$\text{C}_{\frac{0.142}{0.142}}\ \text{H}_{\frac{0.284}{0.142}}\ \text{or}\ \text{CH}_2$$

(Recall that subscripts of "1" are not written, but rather assumed if no other number is present.)

The empirical formula for this compound is thus CH_2. This may or not be the compound's *molecular formula* as well; however, we would need additional information to make that determination (as discussed later in this section).

Consider as another example a sample of compound determined to contain 5.31 g Cl and 8.40 g O. Following the same approach yields a tentative empirical formula of:

$$\text{Cl}_{0.150}\text{O}_{0.525} = \text{Cl}_{\frac{0.150}{0.150}}\ \text{O}_{\frac{0.525}{0.150}} = \text{ClO}_{3.5}$$

In this case, dividing by the smallest subscript still leaves us with a decimal subscript in the empirical formula. To convert this into a whole number, we must multiply each of the subscripts by two, retaining the same atom ratio and yielding Cl_2O_7 as the final empirical formula.

Procedure

In summary, empirical formulas are derived from experimentally measured element masses by:

1. Deriving the number of moles of each element from its mass
2. Dividing each element's molar amount by the smallest molar amount to yield subscripts for a tentative empirical formula
3. Multiplying all coefficients by an integer, if necessary, to ensure that the smallest whole-number ratio of subscripts is obtained

Figure **3.2.1** outlines this procedure in flow chart fashion for a substance containing elements A and X.

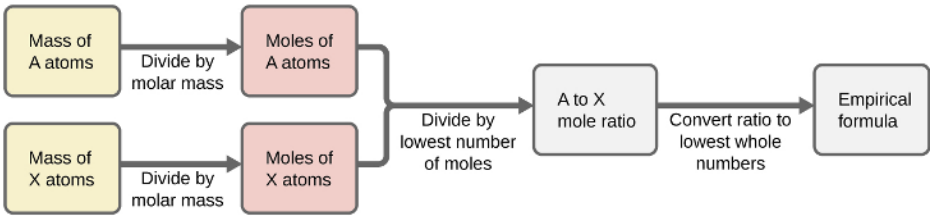

Figure **3.2.1**: The empirical formula of a compound can be derived from the masses of all elements in the sample.

A flow chart is shown that is composed of six boxes, two of which are connected together by a right facing arrow and located above two more that are also connected by a right-facing arrow. These two rows of boxes are connected vertically by a line that leads to a right-facing arrow and the last two boxes, connected by a final right facing arrow. The first two upper boxes have the phrases, “Mass of A atoms” and “Moles of A atoms” respectively, while the arrow that connects them has the phrase, “Divide by molar mass,” written below it. The second two bottom boxes have the phrases, “Mass of X atoms” and “Moles of X atoms” respectively, while the arrow that connects them has the phrase, “Divide by molar mass” written below it. The arrow that connects the upper and lower boxes to the last two boxes has the phrase “Divide by lowest number of moles” written below it. The last two boxes have the phrases, “A to X mole ratio” and “Empirical formula” respectively, while the arrow that connects them has the phrase, “Convert ratio to lowest whole numbers” written below it.

Example **3.2.3**: Determining an Empirical Formula from Masses of Elements

A sample of the black mineral hematite (Figure **3.2.2**), an oxide of iron found in many iron ores, contains 34.97 g of iron and 15.03 g of oxygen. What is the empirical formula of hematite?

Figure **3.2.2**: Hematite is an iron oxide that is used in jewelry. (credit: Mauro Cateb)

Solution

For this problem, we are given the mass in grams of each element. Begin by finding the moles of each:

$$34.97\ \text{g Fe}\left(\frac{\text{mol Fe}}{55.85\ \text{g}}\right) = 0.6261\ \text{mol Fe}$$

$$15.03\ \text{g O}\left(\frac{\text{mol O}}{16.00\ \text{g}}\right) = 0.9394\ \text{mol O}$$

Next, derive the iron-to-oxygen molar ratio by dividing by the lesser number of moles:

$$\frac{0.6261}{0.6261} = 1.000\ \text{mol Fe}$$

$$\frac{0.9394}{0.6261} = 1.500\ \text{mol O}$$

The ratio is 1.000 mol of iron to 1.500 mol of oxygen ($Fe_1O_{1.5}$). Finally, multiply the ratio by two to get the smallest possible whole number subscripts while still maintaining the correct iron-to-oxygen ratio:

$$2(Fe_1O_{1.5}) = Fe_2O_3$$

The empirical formula is $\boldsymbol{Fe_2O_3}$.

? Exercise 3.2.3

What is the empirical formula of a compound if a sample contains 0.130 g of nitrogen and 0.370 g of oxygen?

Answer

N_2O_5

Video* 3.2.1: Additional worked examples illustrating the derivation of empirical formulas are presented in the brief video clip.*

Deriving Empirical Formulas from Percent Composition

Finally, with regard to deriving empirical formulas, consider instances in which a compound's percent composition is available rather than the absolute masses of the compound's constituent elements. In such cases, the percent composition can be used to calculate the masses of elements present in any convenient mass of compound; these masses can then be used to derive the empirical formula in the usual fashion.

✓ Example 3.2.4: Determining an Empirical Formula from Percent Composition

The bacterial fermentation of grain to produce ethanol forms a gas with a percent composition of 27.29% C and 72.71% O (Figure 3.2.3). What is the empirical formula for this gas?

Figure 3.2.3: An oxide of carbon is removed from these fermentation tanks through the large copper pipes at the top. (credit: "Dual Freq"/Wikimedia Commons)

A picture is shown of four copper-colored industrial containers with a large pipe connecting to the top of each one.

Solution

Since the scale for percentages is 100, it is most convenient to calculate the mass of elements present in a sample weighing 100 g. The calculation is "most convenient" because, per the definition for percent composition, the mass of a given element in grams is numerically equivalent to the element's mass percentage. This numerical equivalence results from the definition of the

"percentage" unit, whose name is derived from the Latin phrase *per centum* meaning "by the hundred." Considering this definition, the mass percentages provided may be more conveniently expressed as fractions:

$$27.29\,\%\,\text{C} = \frac{27.29\ \text{g C}}{100\ \text{g compound}}$$

$$72.71\,\%\,\text{O} = \frac{72.71\ \text{g O}}{100\ \text{g compound}}$$

The molar amounts of carbon and hydrogen in a 100-g sample are calculated by dividing each element's mass by its molar mass:

$$27.29\ \text{g C}\left(\frac{\text{mol C}}{12.01\ \text{g}}\right) = 2.272\ \text{mol C}$$

$$72.71\ \text{g O}\left(\frac{\text{mol O}}{16.00\ \text{g}}\right) = 4.544\ \text{mol O}$$

Coefficients for the tentative empirical formula are derived by dividing each molar amount by the lesser of the two:

$$\frac{2.272\ \text{mol C}}{2.272} = 1$$

$$\frac{4.544\ \text{mol O}}{2.272} = 2$$

Since the resulting ratio is one carbon to two oxygen atoms, the empirical formula is CO_2.

? Exercise 3.2.4

What is the empirical formula of a compound containing 40.0% C, 6.71% H, and 53.28% O?

Answer

CH_2O

Derivation of Molecular Formulas

Recall that empirical formulas are symbols representing the *relative* numbers of a compound's elements. Determining the *absolute* numbers of atoms that compose a single molecule of a covalent compound requires knowledge of both its empirical formula and its molecular mass or molar mass. These quantities may be determined experimentally by various measurement techniques. Molecular mass, for example, is often derived from the mass spectrum of the compound (see discussion of this technique in the previous chapter on atoms and molecules). Molar mass can be measured by a number of experimental methods, many of which will be introduced in later chapters of this text.

Molecular formulas are derived by comparing the compound's molecular or molar mass to its empirical formula mass. As the name suggests, an empirical formula mass is the sum of the average atomic masses of all the atoms represented in an empirical formula. If we know the molecular (or molar) mass of the substance, we can divide this by the empirical formula mass in order to identify the number of empirical formula units per molecule, which we designate as *n*:

$$\frac{\text{molecular or molar mass}\left(\text{amu or }\frac{\text{g}}{\text{mol}}\right)}{\text{empirical formula mass}\left(\text{amu or }\frac{\text{g}}{\text{mol}}\right)} = n\ \text{formula units/molecule}$$

The molecular formula is then obtained by multiplying each subscript in the empirical formula by *n*, as shown by the generic empirical formula A_xB_y:

Double subscripts: use braces to clarify

For example, consider a covalent compound whose empirical formula is determined to be CH_2O. The empirical formula mass for this compound is approximately 30 amu (the sum of 12 amu for one C atom, 2 amu for two H atoms, and 16 amu for one O atom). If the compound's molecular mass is determined to be 180 amu, this indicates that molecules of this compound contain six times the number of atoms represented in the empirical formula:

$$\frac{180\ \text{amu/molecule}}{30\ \frac{\text{amu}}{\text{formula unit}}} = 6\ \text{formula units/molecule}$$

Molecules of this compound are then represented by molecular formulas whose subscripts are six times greater than those in the empirical formula:

$$(CH_2O)_6 = C_6H_{12}O_6$$

Note that this same approach may be used when the molar mass (g/mol) instead of the molecular mass (amu) is used. In this case, we are merely considering one mole of empirical formula units and molecules, as opposed to single units and molecules.

Example 3.2.5: Determination of the Molecular Formula for Nicotine

Nicotine, an alkaloid in the nightshade family of plants that is mainly responsible for the addictive nature of cigarettes, contains 74.02% C, 8.710% H, and 17.27% N. If 40.57 g of nicotine contains 0.2500 mol nicotine, what is the molecular formula?

Solution

Determining the molecular formula from the provided data will require comparison of the compound's empirical formula mass to its molar mass. As the first step, use the percent composition to derive the compound's empirical formula. Assuming a convenient, a 100-g sample of nicotine yields the following molar amounts of its elements:

$$(74.02\ \text{g C})\left(\frac{1\ \text{mol C}}{12.01\ \text{g C}}\right) = 6.163\ \text{mol C} \tag{3.2.1}$$

$$(8.710\ \text{g H})\left(\frac{1\ \text{mol H}}{1.01\ \text{g H}}\right) = 8.624\ \text{mol H} \tag{3.2.2}$$

$$(17.27\ \text{g N})\left(\frac{1\ \text{mol N}}{14.01\ \text{g N}}\right) = 1.233\ \text{mol N} \tag{3.2.3}$$

Next, we calculate the molar ratios of these elements relative to the least abundant element, **N**.

$$6.163\ \text{mol C} / 1.233\ \text{mol N} = 5$$

$$8.264\ \text{mol H} / 1.233\ \text{mol N} = 7$$

$$1.233\ \text{mol N} / 1.233\ \text{mol N} = 1$$

$$1.233/1.233 = 1.000\ \text{mol N}$$

$$6.163/1.233 = 4.998\ \text{mol C}$$

$$8.624/1.233 = 6.994\ \text{mol H}$$

The C-to-N and H-to-N molar ratios are adequately close to whole numbers, and so the empirical formula is C_5H_7N. The empirical formula mass for this compound is therefore 81.13 amu/formula unit, or 81.13 g/mol formula unit.

We calculate the molar mass for nicotine from the given mass and molar amount of compound:

$$\frac{40.57\ \text{g nicotine}}{0.2500\ \text{mol nicotine}} = \frac{162.3\ \text{g}}{\text{mol}}$$

Comparing the molar mass and empirical formula mass indicates that each nicotine molecule contains two formula units:

$$\frac{162.3\ \text{g/mol}}{81.13\ \frac{\text{g}}{\text{formula unit}}} = 2\ \text{formula units/molecule}$$

Thus, we can derive the molecular formula for nicotine from the empirical formula by multiplying each subscript by two:

$$(C_5H_7N)_2 = C_{10}H_{14}N_2$$

Exercise 3.2.5

What is the molecular formula of a compound with a percent composition of 49.47% C, 5.201% H, 28.84% N, and 16.48% O, and a molecular mass of 194.2 amu?

Answer

$C_8H_{10}N_4O_2$

Summary

The chemical identity of a substance is defined by the types and relative numbers of atoms composing its fundamental entities (molecules in the case of covalent compounds, ions in the case of ionic compounds). A compound's percent composition provides the mass percentage of each element in the compound, and it is often experimentally determined and used to derive the compound's empirical formula. The empirical formula mass of a covalent compound may be compared to the compound's molecular or molar mass to derive a molecular formula.

Key Equations

- $\%X = \frac{\text{mass X}}{\text{mass compound}} \times 100\%$
- $\frac{\text{molecular or molar mass}\left(\text{amu or } \frac{\text{g}}{\text{mol}}\right)}{\text{empirical formula mass}\left(\text{amu or } \frac{\text{g}}{\text{mol}}\right)} = n \text{ formula units/molecule}$
- $(A_xB_y)_n = A_{nx}B_{ny}$

Glossary

percent composition

percentage by mass of the various elements in a compound

empirical formula mass

sum of average atomic masses for all atoms represented in an empirical formula

This page titled 3.2: Determining Empirical and Molecular Formulas is shared under a CC BY license and was authored, remixed, and/or curated by OpenStax.

- **3.2: Determining Empirical and Molecular Formulas** by OpenStax is licensed CC BY 4.0. Original source: https://openstax.org/details/books/chemistry-2e.

3.3: Molarity

Learning Objectives

- Describe the fundamental properties of solutions
- Calculate solution concentrations using molarity
- Perform dilution calculations using the dilution equation

In preceding sections, we focused on the composition of substances: samples of matter that contain only one type of element or compound. However, mixtures—samples of matter containing two or more substances physically combined—are more commonly encountered in nature than are pure substances. Similar to a pure substance, the relative composition of a mixture plays an important role in determining its properties. The relative amount of oxygen in a planet's atmosphere determines its ability to sustain aerobic life. The relative amounts of iron, carbon, nickel, and other elements in steel (a mixture known as an "alloy") determine its physical strength and resistance to corrosion. The relative amount of the active ingredient in a medicine determines its effectiveness in achieving the desired pharmacological effect. The relative amount of sugar in a beverage determines its sweetness (Figure **3.3.1**). In this section, we will describe one of the most common ways in which the relative compositions of mixtures may be quantified.

Figure **3.3.1**: Sugar is one of many components in the complex mixture known as coffee. The amount of sugar in a given amount of coffee is an important determinant of the beverage's sweetness. (credit: Jane Whitney)

Solutions

We have previously defined solutions as homogeneous mixtures, meaning that the composition of the mixture (and therefore its properties) is uniform throughout its entire volume. Solutions occur frequently in nature and have also been implemented in many forms of manmade technology. We will explore a more thorough treatment of solution properties in the chapter on solutions and colloids, but here we will introduce some of the basic properties of solutions.

The relative amount of a given solution component is known as its concentration. Often, though not always, a solution contains one component with a concentration that is significantly greater than that of all other components. This component is called the solvent and may be viewed as the medium in which the other components are dispersed, or dissolved. Solutions in which water is the solvent are, of course, very common on our planet. A solution in which water is the solvent is called an aqueous solution.

A solute is a component of a solution that is typically present at a much lower concentration than the solvent. Solute concentrations are often described with qualitative terms such as dilute (of relatively low concentration) and concentrated (of relatively high concentration).

Concentrations may be quantitatively assessed using a wide variety of measurement units, each convenient for particular applications. Molarity (M) is a useful concentration unit for many applications in chemistry. Molarity is defined as the number of moles of solute in exactly 1 liter (1 L) of the solution:

$$M = \frac{\text{mol solute}}{\text{L solution}} \tag{3.3.1}$$

Example 3.3.1: Calculating Molar Concentrations

A 355-mL soft drink sample contains 0.133 mol of sucrose (table sugar). What is the molar concentration of sucrose in the beverage?

Solution

Since the molar amount of solute and the volume of solution are both given, the molarity can be calculated using the definition of molarity. Per this definition, the solution volume must be converted from mL to L:

$$\begin{aligned} M &= \frac{mol\ solute}{L\ solution} \\ &= \frac{0.133\ mol}{355\ mL \times \frac{1\ L}{1000\ mL}} \\ &= 0.375\ M \end{aligned}$$

Exercise 3.3.1

A teaspoon of table sugar contains about 0.01 mol sucrose. What is the molarity of sucrose if a teaspoon of sugar has been dissolved in a cup of tea with a volume of 200 mL?

Answer

0.05 M

Example 3.3.2: Deriving Moles and Volumes from Molar Concentrations

How much sugar (mol) is contained in a modest sip (~10 mL) of the soft drink from Example **3.3.1**?

Solution

In this case, we can rearrange the definition of molarity to isolate the quantity sought, moles of sugar. We then substitute the value for molarity that we derived in Example 3.4.2, 0.375 *M*:

$$M = \frac{\text{mol solute}}{\text{L solution}} \tag{3.3.2}$$

Multiple \label

Exercise 3.3.2

What volume (mL) of the sweetened tea described in Example **3.3.1** contains the same amount of sugar (mol) as 10 mL of the soft drink in this example?

Answer

80 mL

Example 3.3.3: Calculating Molar Concentrations from the Mass of Solute

Distilled white vinegar (Figure **3.3.2**) is a solution of acetic acid, CH_3CO_2H, in water. A 0.500-L vinegar solution contains 25.2 g of acetic acid. What is the concentration of the acetic acid solution in units of molarity?

Figure **3.3.3**: Distilled white vinegar is a solution of acetic acid in water.

A label on a container is shown. The label has a picture of a salad with the words “Distilled White Vinegar,” and, “Reduced with water to 5% acidity,” written above it.

Solution

As in previous examples, the definition of molarity is the primary equation used to calculate the quantity sought. In this case, the mass of solute is provided instead of its molar amount, so we must use the solute’s molar mass to obtain the amount of solute in moles:

$$M = \frac{\text{mol solute}}{\text{L solution}} = \frac{25.2\ \text{g}\ \ce{CH3CO2H} \times \frac{1\ \text{mol}\ \ce{CH3CO2H}}{60.052\ \text{g}\ \ce{CH3CO2H}}}{0.500\ \text{L solution}} = 0.839\ M \tag{3.3.3}$$

$$M = \frac{0.839\ \text{mol solute}}{1.00\ \text{L solution}}$$

Nov 29, 2019, 5:24 PM

$$M = \frac{\text{mol solute}}{\text{L solution}} = 0.839\ M \tag{3.3.4}$$

? Exercise 3.3.3

Calculate the molarity of 6.52 g of $\ce{CoCl2}$ (128.9 g/mol) dissolved in an aqueous solution with a total volume of 75.0 mL.

Answer

0.674 M

✓ Example 3.3.4: Determining the Mass of Solute in a Given Volume of Solution

How many grams of NaCl are contained in 0.250 L of a 5.30-*M* solution?

Solution

The volume and molarity of the solution are specified, so the amount (mol) of solute is easily computed as demonstrated in Example **3.3.3**:

$$M = \frac{\text{mol solute}}{\text{L solution}} \tag{3.3.5}$$

$$\text{mol solute} = M \times \text{L solution} \tag{3.3.6}$$

$$\text{mol solute} = 5.30\ \frac{\text{mol NaCl}}{\text{L}} \times 0.250\ \text{L} = 1.325\ \text{mol NaCl} \tag{3.3.7}$$

Finally, this molar amount is used to derive the mass of NaCl:

$$1.325\ \text{mol NaCl} \times \frac{58.44\ \text{g NaCl}}{\text{mol NaCl}} = 77.4\ \text{g NaCl} \tag{3.3.8}$$

? Exercise 3.3.4

How many grams of $CaCl_2$ (110.98 g/mol) are contained in 250.0 mL of a 0.200-M solution of calcium chloride?

Answer

5.55 g $CaCl_2$

When performing calculations stepwise, as in Example **3.3.3**, it is important to refrain from rounding any intermediate calculation results, which can lead to rounding errors in the final result. In Example **3.3.4**, the molar amount of NaCl computed in the first step, 1.325 mol, would be properly rounded to 1.32 mol if it were to be reported; however, although the last digit (5) is not significant, it must be retained as a guard digit in the intermediate calculation. If we had not retained this guard digit, the final calculation for the mass of NaCl would have been 77.1 g, a difference of 0.3 g.

In addition to retaining a guard digit for intermediate calculations, we can also avoid rounding errors by performing computations in a single step (Example **3.3.5**). This eliminates intermediate steps so that only the final result is rounded.

✓ Example 3.3.5: Determining the Volume of Solution

In Example **3.3.3**, we found the typical concentration of vinegar to be 0.839 *M*. What volume of vinegar contains 75.6 g of acetic acid?

Solution

First, use the molar mass to calculate moles of acetic acid from the given mass:

$$\text{g solute} \times \frac{\text{mol solute}}{\text{g solute}} = \text{mol solute} \tag{3.3.9}$$

Then, use the molarity of the solution to calculate the volume of solution containing this molar amount of solute:

$$\text{mol solute} \times \frac{\text{L solution}}{\text{mol solute}} = \text{L solution} \tag{3.3.10}$$

Combining these two steps into one yields:

$$\text{g solute} \times \frac{\text{mol solute}}{\text{g solute}} \times \frac{\text{L solution}}{\text{mol solute}} = \text{L solution} \tag{3.3.11}$$

$$75.6\ \text{g } CH_3CO_2H \left(\frac{\text{mol } CH_3CO_2H}{60.05\ \text{g}}\right)\left(\frac{\text{L solution}}{0.839\ \text{mol } CH_3CO_2H}\right) = 1.50\ \text{L solution} \tag{3.3.12}$$

? Exercise 3.3.5:

What volume of a 1.50-M KBr solution contains 66.0 g KBr?

Answer

0.370 L

Dilution of Solutions

Dilution is the process whereby the concentration of a solution is lessened by the addition of solvent. For example, we might say that a glass of iced tea becomes increasingly diluted as the ice melts. The water from the melting ice increases the volume of the

solvent (water) and the overall volume of the solution (iced tea), thereby reducing the relative concentrations of the solutes that give the beverage its taste (Figure **3.3.2**).



Figure **3.3.2**: Both solutions contain the same mass of copper nitrate. The solution on the right is more dilute because the copper nitrate is dissolved in more solvent. (credit: Mark Ott).

This figure shows two graduated cylinders side-by-side. The first has about half as much blue liquid as the second. The blue liquid is darker in the first cylinder than in the second.

Dilution is also a common means of preparing solutions of a desired concentration. By adding solvent to a measured portion of a more concentrated *stock solution*, we can achieve a particular concentration. For example, commercial pesticides are typically sold as solutions in which the active ingredients are far more concentrated than is appropriate for their application. Before they can be used on crops, the pesticides must be diluted. This is also a very common practice for the preparation of a number of common laboratory reagents (Figure **3.3.3**).

Figure **3.3.3**: A solution of $KMnO_4$ is prepared by mixing water with 4.74 g of KMnO4 in a flask. (credit: modification of work by Mark Ott)

This figure shows two photos. In the first, there is an empty glass container, 4.75 g of K M n O subscript 4 powder on a white circle, and a bottle of distilled water. In the second photo the powder and about half the water have been added to the glass container. The liquid in the glass container is almost black in color.

A simple mathematical relationship can be used to relate the volumes and concentrations of a solution before and after the dilution process. According to the definition of molarity, the molar amount of solute in a solution is equal to the product of the solution's molarity and its volume in liters:

$$n = ML$$

Expressions like these may be written for a solution before and after it is diluted:

$$n_1 = M_1L_1$$

$$n_2 = M_2L_2$$

where the subscripts "1" and "2" refer to the solution before and after the dilution, respectively. Since the dilution process *does not change the amount of solute in the solution*, $n_1 = n_2$. Thus, these two equations may be set equal to one another:

$$M_1L_1 = M_2L_2$$

This relation is commonly referred to as the dilution equation. Although we derived this equation using molarity as the unit of concentration and liters as the unit of volume, other units of concentration and volume may be used, so long as the units properly cancel per the factor-label method. Reflecting this versatility, the dilution equation is often written in the more general form:

$$C_1V_1 = C_2V_2$$

where C and V are concentration and volume, respectively.

Example 3.3.6: Determining the Concentration of a Diluted Solution

If 0.850 L of a 5.00-*M* solution of copper nitrate, $Cu(NO_3)_2$, is diluted to a volume of 1.80 L by the addition of water, what is the molarity of the diluted solution?

Solution

We are given the volume and concentration of a stock solution, V_1 and C_1, and the volume of the resultant diluted solution, V_2. We need to find the concentration of the diluted solution, C_2. We thus rearrange the dilution equation in order to isolate C_2:

$$C_1V_1 = C_2V_2$$

$$C_2 = \frac{C_1V_1}{V_2}$$

Since the stock solution is being diluted by more than two-fold (volume is increased from 0.85 L to 1.80 L), we would expect the diluted solution's concentration to be less than one-half 5 *M*. We will compare this ballpark estimate to the calculated result to check for any gross errors in computation (for example, such as an improper substitution of the given quantities). Substituting the given values for the terms on the right side of this equation yields:

$$C_2 = \frac{0.850\ \text{L} \times 5.00\ \frac{\text{mol}}{\text{L}}}{1.80\ \text{L}} = 2.36\ M$$

This result compares well to our ballpark estimate (it's a bit less than one-half the stock concentration, 5 *M*).

Exercise 3.3.6

What is the concentration of the solution that results from diluting 25.0 mL of a 2.04-M solution of CH3OH to 500.0 mL?

Answer

0.102 M CH_3OH

Example 3.3.7: Volume of a Diluted Solution

What volume of 0.12 *M* HBr can be prepared from 11 mL (0.011 L) of 0.45 *M* HBr?

Solution

We are given the volume and concentration of a stock solution, V_1 and C_1, and the concentration of the resultant diluted solution, C_2. We need to find the volume of the diluted solution, V_2. We thus rearrange the dilution equation in order to isolate V_2:

$$C_1V_1 = C_2V_2$$

$$V_2 = \frac{C_1V_1}{C_2}$$

Since the diluted concentration (0.12 *M*) is slightly more than one-fourth the original concentration (0.45 *M*), we would expect the volume of the diluted solution to be roughly four times the original volume, or around 44 mL. Substituting the given values and solving for the unknown volume yields:

$$V_2 = \frac{(0.45\ M)(0.011\ \text{L})}{(0.12\ M)}$$

$$V_2 = 0.041\ \text{L}$$

The volume of the 0.12-*M* solution is 0.041 L (41 mL). The result is reasonable and compares well with our rough estimate.

? Exercise 3.3.7

A laboratory experiment calls for 0.125 M HNO_3. What volume of 0.125 M HNO_3 can be prepared from 0.250 L of 1.88 M HNO_3?

Answer

3.76 L

✓ Example 3.3.8: Volume of a Concentrated Solution Needed for Dilution

What volume of 1.59 *M* KOH is required to prepare 5.00 L of 0.100 *M* KOH?

Solution

We are given the concentration of a stock solution, C_1, and the volume and concentration of the resultant diluted solution, V_2 and C_2. We need to find the volume of the stock solution, V_1. We thus rearrange the dilution equation in order to isolate V_1:

$$C_1V_1 = C_2V_2$$

$$V_1 = \frac{C_2V_2}{C_1}$$

Since the concentration of the diluted solution 0.100 *M* is roughly one-sixteenth that of the stock solution (1.59 *M*), we would expect the volume of the stock solution to be about one-sixteenth that of the diluted solution, or around 0.3 liters. Substituting the given values and solving for the unknown volume yields:

$$V_1 = \frac{(0.100\ M)(5.00\ \text{L})}{1.59\ M}$$

$$V_1 = 0.314\ \text{L}$$

Thus, we would need 0.314 L of the 1.59-*M* solution to prepare the desired solution. This result is consistent with our rough estimate.

? Exercise 3.3.8

What volume of a 0.575-M solution of glucose, $C_6H_{12}O_6$, can be prepared from 50.00 mL of a 3.00-M glucose solution?

Answer

0.261

Summary

Solutions are homogeneous mixtures. Many solutions contain one component, called the solvent, in which other components, called solutes, are dissolved. An aqueous solution is one for which the solvent is water. The concentration of a solution is a measure of the relative amount of solute in a given amount of solution. Concentrations may be measured using various units, with one very useful unit being molarity, defined as the number of moles of solute per liter of solution. The solute concentration of a solution may

be decreased by adding solvent, a process referred to as dilution. The dilution equation is a simple relation between concentrations and volumes of a solution before and after dilution.

Key Equations

- $M = \frac{\text{mol solute}}{\text{L solution}}$
- $C_1V_1 = C_2V_2$

Glossary

aqueous solution
solution for which water is the solvent

concentrated
qualitative term for a solution containing solute at a relatively high concentration

concentration
quantitative measure of the relative amounts of solute and solvent present in a solution

dilute
qualitative term for a solution containing solute at a relatively low concentration

dilution
process of adding solvent to a solution in order to lower the concentration of solutes

dissolved
describes the process by which solute components are dispersed in a solvent

molarity (*M*)
unit of concentration, defined as the number of moles of solute dissolved in 1 liter of solution

solute
solution component present in a concentration less than that of the solvent

solvent
solution component present in a concentration that is higher relative to other components

---

This page titled 3.3: Molarity is shared under a CC BY license and was authored, remixed, and/or curated by OpenStax.

- **3.3: Molarity** by OpenStax is licensed CC BY 4.0. Original source: https://openstax.org/details/books/chemistry-2e.

3.4: Other Units for Solution Concentrations

Skills to Develop

- Define the concentration units of mass percentage, volume percentage, mass-volume percentage, parts-per-million (ppm), and parts-per-billion (ppb)
- Perform computations relating a solution's concentration and its components' volumes and/or masses using these units

In the previous section, we introduced molarity, a very useful measurement unit for evaluating the concentration of solutions. However, molarity is only one measure of concentration. In this section, we will introduce some other units of concentration that are commonly used in various applications, either for convenience or by convention.

Mass Percentage

Earlier in this chapter, we introduced percent composition as a measure of the relative amount of a given element in a compound. Percentages are also commonly used to express the composition of mixtures, including solutions. The mass percentage of a solution component is defined as the ratio of the component's mass to the solution's mass, expressed as a percentage:

$$\text{mass percentage} = \frac{\text{mass of component}}{\text{mass of solution}} \times 100\% \tag{3.4.1}$$

We are generally most interested in the mass percentages of solutes, but it is also possible to compute the mass percentage of solvent.

Mass percentage is also referred to by similar names such as *percent mass*, *percent weight*, *weight/weight percent*, and other variations on this theme. The most common symbol for mass percentage is simply the percent sign, %, although more detailed symbols are often used including %mass, %weight, and (w/w)%. Use of these more detailed symbols can prevent confusion of mass percentages with other types of percentages, such as volume percentages (to be discussed later in this section).

Mass percentages are popular concentration units for consumer products. The label of a typical liquid bleach bottle (Figure **3.4.1**) cites the concentration of its active ingredient, sodium hypochlorite (NaOCl), as being 7.4%. A 100.0-g sample of bleach would therefore contain 7.4 g of NaOCl.

Figure **3.4.1**: Liquid bleach is an aqueous solution of sodium hypochlorite (NaOCl). This brand has a concentration of 7.4% NaOCl by mass.

Example 3.4.1: Calculation of Percent by Mass

A 5.0-g sample of spinal fluid contains 3.75 mg (0.00375 g) of glucose. What is the percent by mass of glucose in spinal fluid?

Solution

The spinal fluid sample contains roughly 4 mg of glucose in 5000 mg of fluid, so the mass fraction of glucose should be a bit less than one part in 1000, or about 0.1%. Substituting the given masses into the equation defining mass percentage yields:

$$\%\,\text{glucose} = \frac{3.75\ \text{mg glucose} \times \frac{1\ \text{g}}{1000\ \text{mg}}}{5.0\ \text{g spinal fluid}} = 0.075\% \tag{3.4.2}$$

The computed mass percentage agrees with our rough estimate (it's a bit less than 0.1%).

Note that while any mass unit may be used to compute a mass percentage (mg, g, kg, oz, and so on), the same unit must be used for both the solute and the solution so that the mass units cancel, yielding a dimensionless ratio. In this case, we converted the units of solute in the numerator from mg to g to match the units in the denominator. We could just as easily have converted the denominator from g to mg instead. As long as identical mass units are used for both solute and solution, the computed mass percentage will be correct.

Exercise 3.4.1

A bottle of a tile cleanser contains 135 g of HCl and 775 g of water. What is the percent by mass of HCl in this cleanser?

Answer

14.8%

Example 3.4.2: Calculations using Mass Percentage

"Concentrated" hydrochloric acid is an aqueous solution of 37.2% HCl that is commonly used as a laboratory reagent. The density of this solution is 1.19 g/mL. What mass of HCl is contained in 0.500 L of this solution?

Solution

The HCl concentration is near 40%, so a 100-g portion of this solution would contain about 40 g of HCl. Since the solution density isn't greatly different from that of water (1 g/mL), a reasonable estimate of the HCl mass in 500 g (0.5 L) of the solution is about five times greater than that in a 100 g portion, or $\mathbf{5 \times 40 = 200\ g}$. To derive the mass of solute in a solution from its mass percentage, we need to know the corresponding mass of the solution. Using the solution density given, we can convert the solution's volume to mass, and then use the given mass percentage to calculate the solute mass. This mathematical approach is outlined in this flowchart:

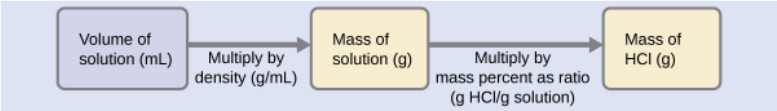

For proper unit cancellation, the 0.500-L volume is converted into 500 mL, and the mass percentage is expressed as a ratio, 37.2 g HCl/g solution:

$$\mathbf{500\ mL\ solution}\left(\frac{\mathbf{1.19\ g\ solution}}{\mathbf{mL\ solution}}\right)\left(\frac{\mathbf{37.2\ g\ HCl}}{\mathbf{100\ g\ solution}}\right) = \mathbf{221\ g\ HCl} \tag{3.4.3}$$

This mass of HCl is consistent with our rough estimate of approximately 200 g.

Exercise 3.4.2

What volume of concentrated HCl solution contains 125 g of HCl?

Answer

282 mL

Volume Percentage

Liquid volumes over a wide range of magnitudes are conveniently measured using common and relatively inexpensive laboratory equipment. The concentration of a solution formed by dissolving a liquid solute in a liquid solvent is therefore often expressed as a volume percentage, %vol or (v/v)%:

Example 3.4.3: Calculations using Volume Percentage

Rubbing alcohol (isopropanol) is usually sold as a 70%vol aqueous solution. If the density of isopropyl alcohol is 0.785 g/mL, how many grams of isopropyl alcohol are present in a 355 mL bottle of rubbing alcohol?

Solution

Per the definition of volume percentage, the isopropanol volume is 70% of the total solution volume. Multiplying the isopropanol volume by its density yields the requested mass:

Exercise 3.4.3

Wine is approximately 12% ethanol (CH_3CH_2OH) by volume. Ethanol has a molar mass of 46.06 g/mol and a density 0.789 g/mL. How many moles of ethanol are present in a 750-mL bottle of wine?

Answer

1.5 mol ethanol

Mass-Volume Percentage

"Mixed" percentage units, derived from the mass of solute and the volume of solution, are popular for certain biochemical and medical applications. A mass-volume percent is a ratio of a solute's mass to the solution's volume expressed as a percentage. The specific units used for solute mass and solution volume may vary, depending on the solution. For example, physiological saline solution, used to prepare intravenous fluids, has a concentration of 0.9% mass/volume (m/v), indicating that the composition is 0.9 g of solute per 100 mL of solution. The concentration of glucose in blood (commonly referred to as "blood sugar") is also typically expressed in terms of a mass-volume ratio. Though not expressed explicitly as a percentage, its concentration is usually given in milligrams of glucose per deciliter (100 mL) of blood (Figure **3.4.2**).

Figure **3.4.2**: "Mixed" mass-volume units are commonly encountered in medical settings. (a) The NaCl concentration of physiological saline is 0.9% (m/v). (b) This device measures glucose levels in a sample of blood. The normal range for glucose concentration in blood (fasting) is around 70–100 mg/dL. (credit a: modification of work by "The National Guard"/Flickr; credit b: modification of work by Biswarup Ganguly).

Parts per Million and Parts per Billion

Very low solute concentrations are often expressed using appropriately small units such as parts per million (ppm) or parts per billion (ppb). Like percentage ("part per hundred") units, ppm and ppb may be defined in terms of masses, volumes, or mixed mass-volume units. There are also ppm and ppb units defined with respect to numbers of atoms and molecules.

The mass-based definitions of ppm and ppb are given here:

$$\text{ppm} = \frac{\text{mass solute}}{\text{mass solution}} \times 10^6 \text{ ppm} \tag{3.4.4}$$

$$\text{ppb} = \frac{\text{mass solute}}{\text{mass solution}} \times 10^9 \text{ ppb} \tag{3.4.5}$$

Both ppm and ppb are convenient units for reporting the concentrations of pollutants and other trace contaminants in water. Concentrations of these contaminants are typically very low in treated and natural waters, and their levels cannot exceed relatively low concentration thresholds without causing adverse effects on health and wildlife. For example, the EPA has identified the maximum safe level of fluoride ion in tap water to be 4 ppm. Inline water filters are designed to reduce the concentration of fluoride and several other trace-level contaminants in tap water (Figure **3.4.3**).

(a) (b)

Figure 3.4.3: (a) In some areas, trace-level concentrations of contaminants can render unfiltered tap water unsafe for drinking and cooking. (b) Inline water filters reduce the concentration of solutes in tap water. (credit a: modification of work by Jenn Durfey; credit b: modification of work by "vastateparkstaff"/Wikimedia commons).

Example 3.4.4: Parts per Million and Parts per Billion Concentrations

According to the EPA, when the concentration of lead in tap water reaches 15 ppb, certain remedial actions must be taken. What is this concentration in ppm? At this concentration, what mass of lead (μg) would be contained in a typical glass of water (300 mL)?

Solution

The definitions of the ppm and ppb units may be used to convert the given concentration from ppb to ppm. Comparing these two unit definitions shows that ppm is 1000 times greater than ppb (1 ppm = 10^3 ppb). Thus:

$$15 \cancel{\text{ ppb}} \times \frac{1 \text{ ppm}}{10^3 \cancel{\text{ ppb}}} = 0.015 \text{ ppm} \tag{3.4.6}$$

The definition of the ppb unit may be used to calculate the requested mass if the mass of the solution is provided. However, only the volume of solution (300 mL) is given, so we must use the density to derive the corresponding mass. We can assume the density of tap water to be roughly the same as that of pure water (~1.00 g/mL), since the concentrations of any dissolved substances should not be very large. Rearranging the equation defining the ppb unit and substituting the given quantities yields:

$$\text{ppb} = \frac{\text{mass solute}}{\text{mass solution}} \times 10^9 \text{ ppb} \tag{3.4.7}$$

$$\text{mass solute} = \frac{\text{ppb} \times \text{mass solution}}{10^9 \text{ ppb}} \tag{3.4.8}$$

$$\text{mass solute} = \frac{15 \text{ ppb} \times 300 \text{ mL} \times \frac{1.00 \text{ g}}{\text{mL}}}{10^9 \text{ ppb}} = 4.5 \times 10^{-6} \text{ g} \tag{3.4.9}$$

Finally, convert this mass to the requested unit of micrograms:

$$4.5 \times 10^{-6} \text{ g} \times \frac{1 \ \mu\text{g}}{10^{-6} \text{ g}} = 4.5 \ \mu\text{g} \tag{3.4.10}$$

Exercise 3.4.4

A 50.0-g sample of industrial wastewater was determined to contain 0.48 mg of mercury. Express the mercury concentration of the wastewater in ppm and ppb units.

Answer

9.6 ppm, 9600 ppb

Summary

In addition to molarity, a number of other solution concentration units are used in various applications. Percentage concentrations based on the solution components' masses, volumes, or both are useful for expressing relatively high concentrations, whereas lower concentrations are conveniently expressed using ppm or ppb units. These units are popular in environmental, medical, and other fields where mole-based units such as molarity are not as commonly used.

Glossary

mass percentage
: ratio of solute-to-solution mass expressed as a percentage

mass-volume percent
: ratio of solute mass to solution volume, expressed as a percentage

parts per billion (ppb)
: ratio of solute-to-solution mass multiplied by 10^9

parts per million (ppm)
: ratio of solute-to-solution mass multiplied by 10^6

volume percentage
: ratio of solute-to-solution volume expressed as a percentage

Contributors

- Paul Flowers (University of North Carolina - Pembroke), Klaus Theopold (University of Delaware) and Richard Langley (Stephen F. Austin State University) with contributing authors. Textbook content produced by OpenStax College is licensed under a Creative Commons Attribution License 4.0 license. Download for free at http://cnx.org/contents/85abf193-2bd...a7ac8df6@9.110).

This page titled 3.4: Other Units for Solution Concentrations is shared under a CC BY license and was authored, remixed, and/or curated by OpenStax.

CHAPTER OVERVIEW

4: Stoichiometry of Chemical Reactions

A general chemistry Libretexts Textmap organized around the textbook
General Chemistry -Atoms First
By OpenStax

This chapter will describe how to symbolize chemical reactions using chemical equations, how to classify some common chemical reactions by identifying patterns of reactivity, and how to determine the quantitative relations between the amounts of substances involved in chemical reactions—that is, the reaction *stoichiometry*.

Sections

4.1: Prelude to Stoichiometry
4.2: Writing and Balancing Chemical Equations
4.3: Classifying Chemical Reactions
4.4: Reaction Stoichiometry
4.5: Reaction Yields
4.6: Quantitative Chemical Analysis

Contributors

- Paul Flowers (University of North Carolina - Pembroke), Klaus Theopold (University of Delaware) and Richard Langley (Stephen F. Austin State University) with contributing authors. Textbook content produced by OpenStax College is licensed under a Creative Commons Attribution License 4.0 license. Download for free at http://cnx.org/contents/85abf193-2bd...a7ac8df6@9.110).

This page titled 4: Stoichiometry of Chemical Reactions is shared under a CC BY license and was authored, remixed, and/or curated by OpenStax.

4.1: Prelude to Stoichiometry

Solid-fuel rockets are a central feature in the world's space exploration programs, including the new Space Launch System being developed by the National Aeronautics and Space Administration (NASA) to replace the retired Space Shuttle fleet (Figure **4.1.1**). The engines of these rockets rely on carefully prepared solid mixtures of chemicals combined in precisely measured amounts. Igniting the mixture initiates a vigorous chemical reaction that rapidly generates large amounts of gaseous products. These gases are ejected from the rocket engine through its nozzle, providing the thrust needed to propel heavy payloads into space. Both the nature of this chemical reaction and the relationships between the amounts of the substances being consumed and produced by the reaction are critically important considerations that determine the success of the technology. This chapter will describe how to symbolize chemical reactions using chemical equations, how to classify some common chemical reactions by identifying patterns of reactivity, and how to determine the quantitative relations between the amounts of substances involved in chemical reactions—that is, the reaction *stoichiometry*.

Figure **4.1.1**: Many modern rocket fuels are solid mixtures of substances combined in carefully measured amounts and ignited to yield a thrust-generating chemical reaction. (credit: modification of work by NASA)

An image is shown of a rocket that appears to have just passed through a layer of clouds as it travels skyward. A bright white light is seen in the upper right corner of the image. To the lower left appears the layer of clouds and the bottom of the rocket with fire projecting from the fuel cones at its base.

This page titled 4.1: Prelude to Stoichiometry is shared under a CC BY license and was authored, remixed, and/or curated by OpenStax.

- **4.1: Prelude to Stoichiometry** by OpenStax is licensed CC BY 4.0. Original source: https://openstax.org/details/books/chemistry-2e.

4.2: Writing and Balancing Chemical Equations

Learning Objectives

- Derive chemical equations from narrative descriptions of chemical reactions.
- Write and balance chemical equations in molecular, total ionic, and net ionic formats.

The preceding chapter introduced the use of element symbols to represent individual atoms. When atoms gain or lose electrons to yield ions, or combine with other atoms to form molecules, their symbols are modified or combined to generate chemical formulas that appropriately represent these species. Extending this symbolism to represent both the identities and the relative quantities of substances undergoing a chemical (or physical) change involves writing and balancing a chemical equation. Consider as an example the reaction between one methane molecule (CH_4) and two diatomic oxygen molecules (O_2) to produce one carbon dioxide molecule (CO_2) and two water molecules (H_2O). The chemical equation representing this process is provided in the upper half of Figure **4.2.1**, with space-filling molecular models shown in the lower half of the figure.

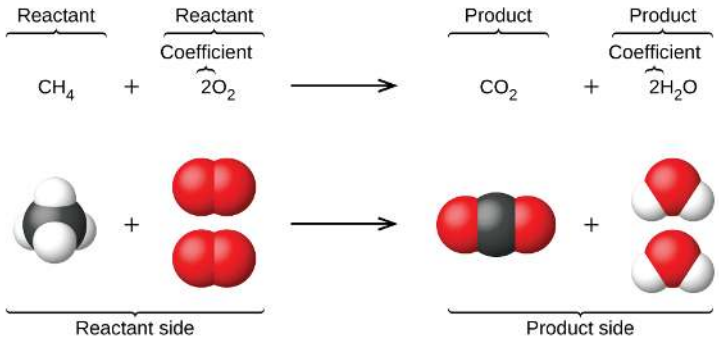

Figure **4.2.1**: The reaction between methane and oxygen to yield carbon dioxide and water (shown at bottom) may be represented by a chemical equation using formulas (top).

This figure shows a balanced chemical equation followed below by a representation of the equation using space-filling models. The equation reads C H subscript 4 plus 2 O subscript 2 arrow C O subscript 2 plus 2 H subscript 2 O. Under the C H subscript 4, the molecule is shown with a central black sphere, representing a C atom, to which 4 smaller white spheres, representing H atoms, are distributed evenly around. All four H atoms are bonded to the central black C atom. This is followed by a plus sign. Under the 2 O subscript 2, two molecules are shown. The molecules are each composed of two red spheres bonded together. The red spheres represent O atoms. To the right of an arrow and under the C O subscript 2, appears a single molecule with a black central sphere with two red spheres bonded to the left and right. Following a plus sign and under the 2 H subscript 2 O, are two molecules, each with a central red sphere and two smaller white spheres attached to the lower right and lower left sides of the central red sphere. Note that in space filling models of molecules, spheres appear slightly compressed in regions where there is a bond between two atoms.

This example illustrates the fundamental aspects of any chemical equation:

1. The substances undergoing reaction are called reactants, and their formulas are placed on the left side of the equation.
2. The substances generated by the reaction are called products, and their formulas are placed on the right sight of the equation.
3. Plus signs (+) separate individual reactant and product formulas, and an arrow (⟶) separates the reactant and product (left and right) sides of the equation.
4. The relative numbers of reactant and product species are represented by coefficients (numbers placed immediately to the left of each formula). A coefficient of 1 is typically omitted.

It is common practice to use the smallest possible whole-number coefficients in a chemical equation, as is done in this example. Realize, however, that these coefficients represent the *relative* numbers of reactants and products, and, therefore, they may be correctly interpreted as ratios. Methane and oxygen react to yield carbon dioxide and water in a 1:2:1:2 ratio. This ratio is satisfied if the numbers of these molecules are, respectively, 1-2-1-2, or 2-4-2-4, or 3-6-3-6, and so on (Figure **4.2.2**). Likewise, these coefficients may be interpreted with regard to any amount (number) unit, and so this equation may be correctly read in many ways, including:

- *One* methane molecule and *two* oxygen molecules react to yield *one* carbon dioxide molecule and *two* water molecules.

- *One dozen* methane molecules and *two dozen* oxygen molecules react to yield *one dozen* carbon dioxide molecules and *two dozen* water molecules.
- *One mole* of methane molecules and *2 moles* of oxygen molecules react to yield *1 mole* of carbon dioxide molecules and *2 moles* of water molecules.

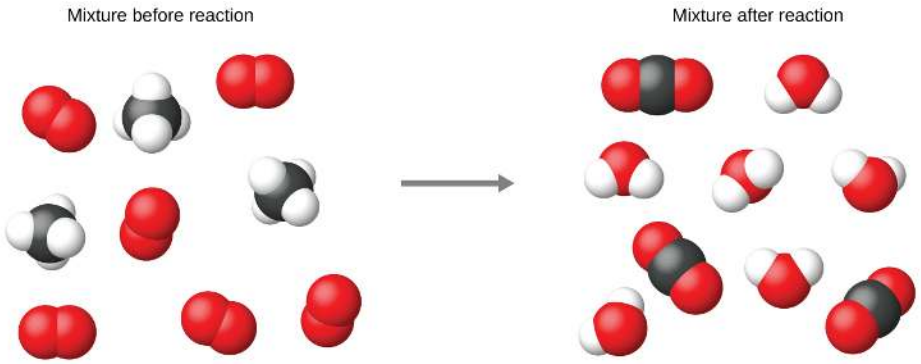

Figure **4.2.2**: Regardless of the absolute number of molecules involved, the ratios between numbers of molecules of each species that react (the reactants) and molecules of each species that form (the products) are the same and are given in the chemical equation.

Balancing Equations

When a chemical equation is balanced it means that equal numbers of atoms for each element involved in the reaction are represented on the reactant and product sides. This is a requirement the equation must satisfy to be consistent with the law of conservation of matter. It may be confirmed by simply summing the numbers of atoms on either side of the arrow and comparing these sums to ensure they are equal. Note that the number of atoms for a given element is calculated by multiplying the coefficient of any formula containing that element by the element's subscript in the formula. If an element appears in more than one formula on a given side of the equation, the number of atoms represented in each must be computed and then added together. For example, both product species in the example reaction, $\mathbf{CO_2}$ and $\mathbf{H_2O}$, contain the element oxygen, and so the number of oxygen atoms on the product side of the equation is

$$\left(1\ \cancel{\mathrm{CO_2\ molecule}} \times \frac{2\ \mathrm{O\ atoms}}{\cancel{\mathrm{CO_2\ molecule}}}\right) + \left(\cancel{2\,\mathrm{H_2O\ molecule}} \times \frac{1\ \mathrm{O\ atom}}{\cancel{\mathrm{H_2O\ molecule}}}\right) = 4\ \mathrm{O\ atoms}$$

The equation for the reaction between methane and oxygen to yield carbon dioxide and water is confirmed to be balanced per this approach, as shown here:

$$\mathbf{CH_4 + 2\,O_2 \rightarrow CO_2 + 2\,H_2O}$$

Equation for the reaction

$$\mathbf{CH_4 + 2\,O_2 \rightarrow CO_2 + 2\,H_2O}$$

Element	Reactants	Products	Balanced?
C	1 × 1 = 1	1 × 1 = 1	1 = 1, yes
H	4 × 1 = 4	2 × 2 = 4	4 = 4, yes
O	2 × 2 = 4	(1 × 2) + (2 × 1) = 4	4 = 4, yes

A balanced chemical equation often may be derived from a qualitative description of some chemical reaction by a fairly simple approach known as balancing by inspection. Consider as an example the decomposition of water to yield molecular hydrogen and oxygen. This process is represented qualitatively by an *unbalanced* chemical equation:

$$\mathbf{H_2O \rightarrow H_2 + O_2} \qquad \textbf{(unbalanced)}$$

Comparing the number of H and O atoms on either side of this equation confirms its imbalance:

Comparisons between H and O atoms

Element	Reactants	Products	Balanced?
H	1 × 2 = 2	1 × 2 = 2	2 = 2, yes
O	1 × 1 = 1	1 × 2 = 2	1 ≠ 2, no

The numbers of H atoms on the reactant and product sides of the equation are equal, but the numbers of O atoms are not. To achieve balance, the *coefficients* of the equation may be changed as needed. Keep in mind, of course, that the *formula subscripts* define, in part, the identity of the substance, and so these cannot be changed without altering the qualitative meaning of the equation. For example, changing the reactant formula from H_2O to H_2O_2 would yield balance in the number of atoms, but doing so also changes the reactant's identity (it's now hydrogen peroxide and not water). The O atom balance may be achieved by changing the coefficient for H_2O to 2.

$$2\,H_2O \rightarrow H_2 + O_2 \qquad \text{(unbalanced)}$$

O atom balance may be achieved by changing the coefficient for H2O to 2

Element	Reactants	Products	Balanced?
H	**2** × 2 = 4	1 × 2 = 2	4 ≠ 2, no
O	2 × 1 = 2	1 × 2 = 2	2 = 2, yes

The H atom balance was upset by this change, but it is easily reestablished by changing the coefficient for the H_2 product to 2.

$$2\,H_2O \rightarrow 2\,H_2 + O_2 \qquad \text{(balanced)}$$

H atom balance upset but easily reestablished by changing the coefficient for the H2 product to 2.

Element	Reactants	Products	Balanced?
H	2 × 2 = 4	**2** × 2 = 2	4 = 4, yes
O	2 × 1 = 2	1 × 2 = 2	2 = 2, yes

These coefficients yield equal numbers of both H and O atoms on the reactant and product sides, and the balanced equation is, therefore:

$$2\,H_2O \rightarrow 2\,H_2 + O_2$$

Example 4.2.1: Balancing Chemical Equations

Write a balanced equation for the reaction of molecular nitrogen (N_2) and oxygen (O_2) to form dinitrogen pentoxide.

Solution

First, write the unbalanced equation.

$$N_2 + O_2 \rightarrow N_2O_5 \qquad \text{(unbalanced)}$$

Next, count the number of each type of atom present in the unbalanced equation.

Unbalanced Equation

Element	Reactants	Products	Balanced?
N	1 × 2 = 2	1 × 2 = 2	2 = 2, yes
O	1 × 2 = 2	1 × 5 = 5	2 ≠ 5, no

Though nitrogen is balanced, changes in coefficients are needed to balance the number of oxygen atoms. To balance the number of oxygen atoms, a reasonable first attempt would be to change the coefficients for the O_2 and N_2O_5 to integers that will yield 10 O atoms (the least common multiple for the O atom subscripts in these two formulas).

$$\mathrm{N_2 + 5\,O_2 \rightarrow 2\,N_2O_5} \qquad \text{(unbalanced)}$$

$$\mathrm{N_2 + 5\,O_2 \rightarrow 2\,N_2O_5} \qquad \text{(unbalanced)}$$

Element	Reactants	Products	Balanced?
N	1 × 2 = 2	**2** × 2 = 4	2 ≠ 4, no
O	**5** × 2 = 10	**2** × 5 = 10	10 = 10, yes

The N atom balance has been upset by this change; it is restored by changing the coefficient for the reactant N_2 to 2.

$$\mathrm{2\,N_2 + 5\,O_2 \rightarrow 2\,N_2O_5}$$

N atom balance upset but restored by changing the coefficient for the reactant N2 to 2.

Element	Reactants	Products	Balanced?
N	**2** × 2 = 4	2 × 2 = 4	4 = 4, yes
O	5 × 2 = 10	2 × 5 = 10	10 = 10, yes

The numbers of N and O atoms on either side of the equation are now equal, and so the equation is balanced.

? Exercise 4.2.1

Write a balanced equation for the decomposition of ammonium nitrate to form molecular nitrogen, molecular oxygen, and water. (Hint: Balance oxygen last, since it is present in more than one molecule on the right side of the equation.)

Answer

$$\mathrm{2\,NH_4NO_3 \rightarrow 2\,N_2 + O_2 + 4\,H_2O}$$

Balancing Reactions Which Contain Polyatomics: Balancing Reactions Which Contain Polyatomics(opens in new window) [youtu.be]

It is sometimes convenient to use fractions instead of integers as intermediate coefficients in the process of balancing a chemical equation. When balance is achieved, all the equation's coefficients may then be multiplied by a whole number to convert the fractional coefficients to integers without upsetting the atom balance. For example, consider the reaction of ethane (C_2H_6) with oxygen to yield H_2O and CO_2, represented by the unbalanced equation:

$$\mathrm{C_2H_6 + O_2 \rightarrow H_2O + CO_2} \qquad \text{(unbalanced)}$$

Following the usual inspection approach, one might first balance C and H atoms by changing the coefficients for the two product species, as shown:

$$C_2H_6 + O_2 \rightarrow 3\,H_2O + 2\,CO_2 \quad \text{(unbalanced)}$$

This results in seven O atoms on the product side of the equation, an odd number—no integer coefficient can be used with the O_2 reactant to yield an odd number, so a fractional coefficient, $\frac{7}{2}$, is used instead to yield a provisional balanced equation:

$$C_2H_6 + \tfrac{7}{2}\,O_2 \rightarrow 3\,H_2O + 2\,CO_2$$

A conventional balanced equation with integer-only coefficients is derived by multiplying each coefficient by 2:

$$2\,C_2H_6 + 7\,O_2 \rightarrow 6\,H_2O + 4\,CO_2$$

Finally with regard to balanced equations, recall that convention dictates use of the *smallest whole-number coefficients*. Although the equation for the reaction between molecular nitrogen and molecular hydrogen to produce ammonia is, indeed, balanced,

$$3\,N_2 + 9\,H_2 \rightarrow 6\,NH_3$$

the coefficients are not the smallest possible integers representing the relative numbers of reactant and product molecules. Dividing each coefficient by the greatest common factor, 3, gives the preferred equation:

$$N_2 + 3\,H_2 \rightarrow 2\,NH_3$$

Phet Simulation

Use this interactive tutorial for additional practice balancing equations.

Additional Information in Chemical Equations

The physical states of reactants and products in chemical equations very often are indicated with a parenthetical abbreviation following the formulas. Common abbreviations include *s* for solids, *l* for liquids, *g* for gases, and *aq* for substances dissolved in water (*aqueous solutions*, as introduced in the preceding chapter). These notations are illustrated in the example equation here:

$$2\,Na\,(s) + 2\,H_2O\,(l) \rightarrow 2\,NaOH\,(aq) + H_2\,(g)$$

This equation represents the reaction that takes place when sodium metal is placed in water. The solid sodium reacts with liquid water to produce molecular hydrogen gas and the ionic compound sodium hydroxide (a solid in pure form, but readily dissolved in water).

Special conditions necessary for a reaction are sometimes designated by writing a word or symbol above or below the equation's arrow. For example, a reaction carried out by heating may be indicated by the uppercase Greek letter delta (Δ) over the arrow.

$$CaCO_3(s) \xrightarrow{\Delta} CaO(s) + CO_2(g)$$

Other examples of these special conditions will be encountered in more depth in later chapters.

Equations for Ionic Reactions

Given the abundance of water on earth, it stands to reason that a great many chemical reactions take place in aqueous media. When ions are involved in these reactions, the chemical equations may be written with various levels of detail appropriate to their intended use. To illustrate this, consider a reaction between ionic compounds taking place in an aqueous solution. When aqueous solutions of $CaCl_2$ and $AgNO_3$ are mixed, a reaction takes place producing aqueous $Ca(NO_3)_2$ and solid $AgCl$:

$$CaCl_2(aq) + 2\,AgNO_3(aq) \rightarrow Ca(NO_3)_2(aq) + 2\,AgCl(s)$$

This balanced equation, derived in the usual fashion, is called a molecular equation because it doesn't explicitly represent the ionic species that are present in solution. When ionic compounds dissolve in water, they may *dissociate* into their constituent ions, which are subsequently dispersed homogenously throughout the resulting solution (a thorough discussion of this important process is provided in the chapter on solutions). Ionic compounds dissolved in water are, therefore, more realistically represented as dissociated ions, in this case:

$$CaCl_2(aq) \rightarrow Ca^{2+}(aq) + 2\,Cl^-(aq)$$

$$2\,AgNO_3(aq) \rightarrow 2\,Ag^+(aq) + 2\,NO_3^-(aq)$$

$$Ca(NO_3)_2(aq) \rightarrow Ca^{2+}(aq) + 2\,NO_3^-(aq)$$

Unlike these three ionic compounds, AgCl does not dissolve in water to a significant extent, as signified by its physical state notation, *(s)*.

Explicitly representing all dissolved ions results in a complete ionic equation. In this particular case, the formulas for the dissolved ionic compounds are replaced by formulas for their dissociated ions:

$$Ca^{2+}(aq) + 2\,Cl^-(aq) + 2\,Ag^+(aq) + 2\,NO_3^-(aq) \rightarrow Ca^{2+}(aq) + 2\,NO_3^-(aq) + 2\,AgCl(s)$$

Examining this equation shows that two chemical species are present in identical form on both sides of the arrow, $Ca^{2+}(aq)$ and $NO_3^-(aq)$. These spectator ions—ions whose presence is required to maintain charge neutrality—are neither chemically nor physically changed by the process, and so they may be eliminated from the equation to yield a more succinct representation called a net ionic equation:

$$\cancel{Ca^{2+}(aq)} + 2\,Cl^-(aq) + 2\,Ag^+(aq) + \cancel{2\,NO_3^-(aq)} \rightarrow \cancel{Ca^{2+}(aq)} + \cancel{2\,NO_3^-(aq)} + 2\,AgCl(s)$$

$$2\,Cl^-(aq) + 2\,Ag^+(aq) \rightarrow 2\,AgCl(s)$$

Following the convention of using the smallest possible integers as coefficients, this equation is then written:

$$Cl^-(aq) + Ag^+(aq) \rightarrow AgCl(s)$$

This net ionic equation indicates that solid silver chloride may be produced from dissolved chloride and silver(I) ions, regardless of the source of these ions. These molecular and complete ionic equations provide additional information, namely, the ionic compounds used as sources of Cl^- and Ag^+.

Example 4.2.2: Molecular and Ionic Equations

When carbon dioxide is dissolved in an aqueous solution of sodium hydroxide, the mixture reacts to yield aqueous sodium carbonate and liquid water. Write balanced molecular, complete ionic, and net ionic equations for this process.

Solution

Begin by identifying formulas for the reactants and products and arranging them properly in chemical equation form:

$$CO_2\,(aq) + NaOH\,(aq) \rightarrow Na_2CO_3\,(aq) + H_2O\,(l) \qquad \text{(unbalanced)}$$

Balance is achieved easily in this case by changing the coefficient for NaOH to 2, resulting in the molecular equation for this reaction:

$$CO_2(aq) + 2\,NaOH(aq) \rightarrow Na_2CO_3\,(aq) + H_2O(l)$$

The two dissolved ionic compounds, NaOH and Na_2CO_3, can be represented as dissociated ions to yield the complete ionic equation:

$$CO_2\,(aq) + 2\,Na^+\,(aq) + 2\,OH^-\,(aq) \rightarrow 2\,Na^+\,(aq) + CO_3^{2-}\,(aq) + H_2O\,(l)$$

Finally, identify the spectator ion(s), in this case $Na^+(aq)$, and remove it from each side of the equation to generate the net ionic equation:

$$CO_2(aq) + \cancel{2\,Na^+(aq)} + 2\,OH^-(aq) \rightarrow \cancel{2\,Na^+(aq)} + CO_3^{2-}(aq) + H_2O(l)$$

$$CO_2(aq) + 2\,OH^-(aq) \rightarrow CO_3^{2-}(aq) + H_2O(l)$$

? Exercise 4.2.2

Diatomic chlorine and sodium hydroxide (lye) are commodity chemicals produced in large quantities, along with diatomic hydrogen, via the electrolysis of brine, according to the following unbalanced equation:

$$\mathrm{NaCl(aq) + H_2O(l) \xrightarrow{electricity} NaOH(aq) + H_2(g) + Cl_2(g)}$$

Write balanced molecular, complete ionic, and net ionic equations for this process.

Answer

Balanced molecular equation:

$$\mathrm{2\,NaCl(aq) + 2\,H_2O(l) \longrightarrow 2\,NaOH(aq) + H_2(g) + Cl_2(g)}$$

Balanced ionic equation:

$$\mathrm{2\,Na^+(aq) + 2\,Cl^-(aq) + 2\,H_2O(l) \longrightarrow 2\,Na^+(aq) + 2\,OH^-(aq) + H_2(g) + Cl_2(g)}$$

Balanced net ionic equation:

$$\mathrm{2\,Cl^-(aq) + 2\,H_2O(l) \longrightarrow 2\,OH^-(aq) + H_2(g) + Cl_2(g)}$$

Key Concepts and Summary

Chemical equations are symbolic representations of chemical and physical changes. Formulas for the substances undergoing the change (reactants) and substances generated by the change (products) are separated by an arrow and preceded by integer coefficients indicating their relative numbers. Balanced equations are those whose coefficients result in equal numbers of atoms for each element in the reactants and products. Chemical reactions in aqueous solution that involve ionic reactants or products may be represented more realistically by complete ionic equations and, more succinctly, by net ionic equations.

Glossary

balanced equation
chemical equation with equal numbers of atoms for each element in the reactant and product

chemical equation
symbolic representation of a chemical reaction

coefficient
number placed in front of symbols or formulas in a chemical equation to indicate their relative amount

complete ionic equation
chemical equation in which all dissolved ionic reactants and products, including spectator ions, are explicitly represented by formulas for their dissociated ions

molecular equation
chemical equation in which all reactants and products are represented as neutral substances

net ionic equation
chemical equation in which only those dissolved ionic reactants and products that undergo a chemical or physical change are represented (excludes spectator ions)

product
substance formed by a chemical or physical change; shown on the right side of the arrow in a chemical equation

reactant

substance undergoing a chemical or physical change; shown on the left side of the arrow in a chemical equation

spectator ion

ion that does not undergo a chemical or physical change during a reaction, but its presence is required to maintain charge neutrality

---

This page titled 4.2: Writing and Balancing Chemical Equations is shared under a CC BY license and was authored, remixed, and/or curated by OpenStax.

- **4.2: Writing and Balancing Chemical Equations** by OpenStax is licensed CC BY 4.0. Original source: https://openstax.org/details/books/chemistry-2e.

4.3: Classifying Chemical Reactions

Learning Objectives

- Define three common types of chemical reactions (precipitation, acid-base, and oxidation-reduction)
- Classify chemical reactions as one of these three types given appropriate descriptions or chemical equations
- Identify common acids and bases
- Predict the solubility of common inorganic compounds by using solubility rules
- Compute the oxidation states for elements in compounds

Humans interact with one another in various and complex ways, and we classify these interactions according to common patterns of behavior. When two humans exchange information, we say they are communicating. When they exchange blows with their fists or feet, we say they are fighting. Faced with a wide range of varied interactions between chemical substances, scientists have likewise found it convenient (or even necessary) to classify chemical interactions by identifying common patterns of reactivity. This module will provide an introduction to three of the most prevalent types of chemical reactions: precipitation, acid-base, and oxidation-reduction.

Precipitation Reactions and Solubility Rules

A precipitation reaction is one in which dissolved substances react to form one (or more) solid products. Many reactions of this type involve the exchange of ions between ionic compounds in aqueous solution and are sometimes referred to as *double displacement*, *double replacement*, or *metathesis* reactions. These reactions are common in nature and are responsible for the formation of coral reefs in ocean waters and kidney stones in animals. They are used widely in industry for production of a number of commodity and specialty chemicals. Precipitation reactions also play a central role in many chemical analysis techniques, including spot tests used to identify metal ions and *gravimetric methods* for determining the composition of matter (see the last module of this chapter).

The extent to which a substance may be dissolved in water, or any solvent, is quantitatively expressed as its solubility, defined as the maximum concentration of a substance that can be achieved under specified conditions. Substances with relatively large solubilities are said to be soluble. A substance will precipitate when solution conditions are such that its concentration exceeds its solubility. Substances with relatively low solubilities are said to be insoluble, and these are the substances that readily precipitate from solution. More information on these important concepts is provided in the text chapter on solutions. For purposes of predicting the identities of solids formed by precipitation reactions, one may simply refer to patterns of solubility that have been observed for many ionic compounds (Table **4.3.1**).

Table **4.3.1**: Solubilities of Common Ionic Compounds in Water

Soluble compounds contain	**Exceptions** to these solubility rules include
• group 1 metal cations (Li^+, Na^+, K^+, Rb^+, and Cs^+) and ammonium ion (NH_4^+) • the halide ions (Cl^-, Br^-, and I^-) • the acetate ($C_2H_3O_2^-$), bicarbonate (HCO_3^-), nitrate (NO_3^-), and chlorate (ClO_3^-) ions • the sulfate (SO_4^-) ion	• halides of Ag^+, Hg_2^{2+}, and Pb^{2+} • sulfates of Ag^+, Ba^{2+}, Ca^{2+}, Hg_2^{2+}, Pb^{2+}, and Sr^{2+}
Insoluble compounds contain	**Exceptions** to these insolubility rules include
• carbonate (CO_3^{2-}), chromate (CrO_4^{2-}), phosphate (PO_4^{3-}), and sulfide (S^{2-}) ions • hydroxide ion (OH^-)	• compounds of these anions with group 1 metal cations and ammonium ion • hydroxides of group 1 metal cations and Ba^{2+}

A vivid example of precipitation is observed when solutions of potassium iodide and lead nitrate are mixed, resulting in the formation of solid lead iodide:

$$2\,KI(aq) + Pb(NO_3)_2(aq) \rightarrow PbI_2(s) + 2\,KNO_3(aq)$$

This observation is consistent with the solubility guidelines: The only insoluble compound among all those involved is lead iodide, one of the exceptions to the general solubility of iodide salts.

The net ionic equation representing this reaction is:

$$Pb^{2+}(aq) + 2\,I^-(aq) \rightarrow PbI_2(s)$$

Lead iodide is a bright yellow solid that was formerly used as an artist's pigment known as iodine yellow (Figure **4.3.1**). The properties of pure PbI_2 crystals make them useful for fabrication of X-ray and gamma ray detectors.

Figure **4.3.1**: A precipitate of PbI_2 forms when solutions containing Pb^{2+} and I^- are mixed. (credit: Der Kreole/Wikimedia Commons)

A photograph is shown of a yellow green opaque substance swirled through a clear, colorless liquid in a test tube.

The solubility guidelines in Table **4.3.1** may be used to predict whether a precipitation reaction will occur when solutions of soluble ionic compounds are mixed together. One merely needs to identify all the ions present in the solution and then consider if possible cation/anion pairing could result in an insoluble compound. For example, mixing solutions of silver nitrate and sodium fluoride will yield a solution containing Ag^+, NO_3^-, Na^+, and F^- ions. Aside from the two ionic compounds originally present in the solutions, $AgNO_3$ and NaF, two additional ionic compounds may be derived from this collection of ions: $NaNO_3$ and AgF. The solubility guidelines indicate all nitrate salts are soluble but that AgF is one of the exceptions to the general solubility of fluoride salts. A precipitation reaction, therefore, is predicted to occur, as described by the following equations:

$$NaF(aq) + AgNO_3(aq) \rightarrow AgF(s) + NaNO_3(aq) \quad \text{(molecular)}$$

$$Ag^+(aq) + F^-(aq) \rightarrow AgF(s) \quad \text{(net ionic)}$$

Example 4.3.1: Predicting Precipitation Reactions

Predict the result of mixing reasonably concentrated solutions of the following ionic compounds. If precipitation is expected, write a balanced net ionic equation for the reaction.

a. potassium sulfate and barium nitrate
b. lithium chloride and silver acetate
c. lead nitrate and ammonium carbonate

Solution

(a) The two possible products for this combination are KNO_3 and $BaSO_4$. The solubility guidelines indicate $BaSO_4$ is insoluble, and so a precipitation reaction is expected. The net ionic equation for this reaction, derived in the manner detailed in the previous module, is

$$Ba^{2+}(aq) + SO_4{}^{2-}(aq) \rightarrow BaSO_4(s)$$

(b) The two possible products for this combination are $LiC_2H_3O_2$ and AgCl. The solubility guidelines indicate AgCl is insoluble, and so a precipitation reaction is expected. The net ionic equation for this reaction, derived in the manner detailed in the previous module, is

$$Ag^+(aq) + Cl^-(aq) \rightarrow AgCl(s)$$

(c) The two possible products for this combination are $PbCO_3$ and NH_4NO_3. The solubility guidelines indicate $PbCO_3$ is insoluble, and so a precipitation reaction is expected. The net ionic equation for this reaction, derived in the manner detailed in the previous module, is

$$Pb^{2+}(aq) + CO_3^{2-}(aq) \rightarrow PbCO_3(s)$$

? Exercise 4.3.1

Which solution could be used to precipitate the barium ion, Ba^{2+}, in a water sample: sodium chloride, sodium hydroxide, or sodium sulfate? What is the formula for the expected precipitate?

Answer

sodium sulfate, $BaSO_4$

Acid-Base Reactions

An acid-base reaction is one in which a hydrogen ion, H^+, is transferred from one chemical species to another. Such reactions are of central importance to numerous natural and technological processes, ranging from the chemical transformations that take place within cells and the lakes and oceans, to the industrial-scale production of fertilizers, pharmaceuticals, and other substances essential to society. The subject of acid-base chemistry, therefore, is worthy of thorough discussion, and a full chapter is devoted to this topic later in the text.

For purposes of this brief introduction, we will consider only the more common types of acid-base reactions that take place in aqueous solutions. In this context, an acid is a substance that will dissolve in water to yield hydronium ions, H_3O^+. As an example, consider the equation shown here:

$$HCl(aq) + H_2O(aq) \rightarrow Cl^-(aq) + H_3O^+(aq)$$

The process represented by this equation confirms that hydrogen chloride is an acid. When dissolved in water, H_3O^+ ions are produced by a chemical reaction in which H^+ ions are transferred from HCl molecules to H_2O molecules (Figure **4.3.2**).

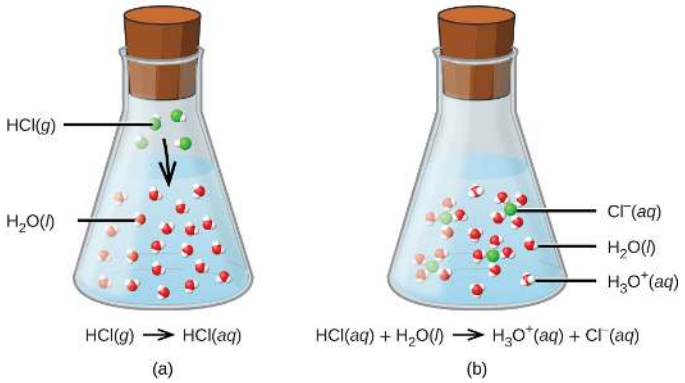

Figure 4.3.2: When hydrogen chloride gas dissolves in water, (a) it reacts as an acid, transferring protons to water molecules to yield (b) hydronium ions (and solvated chloride ions)

This figure shows two flasks, labeled a and b. The flasks are both sealed with stoppers and are nearly three-quarters full of a liquid. Flask a is labeled H C l followed by g in parentheses. In the liquid there are approximately twenty space-filling molecular models composed of one red sphere and two smaller attached white spheres. The label H subscript 2 O followed by a q in parentheses is connected with a line to one of these models. In the space above the liquid in the flask, four space filling molecular models composed of one larger green sphere to which a smaller white sphere is bonded are shown. To one of these models, the label H C l followed by g in parentheses is attached with a line segment. An arrow is drawn from the space above the liquid pointing down into the liquid below. Flask b is labeled H subscript 3 O superscript positive sign followed by a q in parentheses. This is followed by a plus sign and C l superscript negative sign which is also followed by a q in parentheses. In this flask, no molecules are shown in the open space above the liquid. A label, C l superscript negative sign followed by a q in parentheses, is connected with a line segment to a green sphere. This sphere is surrounded by four molecules composed each of one red sphere and two white smaller spheres. A few of these same molecules appear separate from the green spheres in the liquid. A line segment connects one of them to the label H subscript 2 O which is followed by l in parentheses. There are a few molecules formed from one central larger red sphere to which three smaller white spheres are bonded. A line segment is drawn from one of these to the label H subscript 3 O superscript positive sign, followed by a q in parentheses.

The nature of HCl is such that its reaction with water as just described is essentially 100% efficient: Virtually every HCl molecule that dissolves in water will undergo this reaction. Acids that completely react in this fashion are called strong acids, and HCl is one among just a handful of common acid compounds that are classified as strong (Table 4.3.1). A far greater number of compounds behave as weak acids and only partially react with water, leaving a large majority of dissolved molecules in their original form and generating a relatively small amount of hydronium ions. Weak acids are commonly encountered in nature, being the substances partly responsible for the tangy taste of citrus fruits, the stinging sensation of insect bites, and the unpleasant smells associated with body odor. A familiar example of a weak acid is acetic acid, the main ingredient in food vinegars:

$$\mathrm{CH_3CO_2H}(aq) + \mathrm{H_2O}(l) \rightleftharpoons \mathrm{CH_3CO_2^-}(aq) + \mathrm{H_3O^+}(aq)$$

When dissolved in water under typical conditions, only about 1% of acetic acid molecules are present in the ionized form, $\mathrm{CH_3CO_2^-}$ (Figure 4.3.3). (The use of a double-arrow in the equation above denotes the partial reaction aspect of this process, a concept addressed fully in the chapters on chemical equilibrium.)



(a) (b)

Figure **4.3.3**: (a) Fruits such as oranges, lemons, and grapefruit contain the weak acid citric acid. (b) Vinegars contain the weak acid acetic acid. (credit a: modification of work by Scott Bauer; credit b: modification of work by Brücke-Osteuropa/Wikimedia Commons)

This figure contains two images, each with an associated structural formula provided in the lower left corner of the image. The first image is a photograph of a variety of thinly sliced, circular cross sections of citrus fruits ranging in color for green to yellow, to orange and reddish-orange. The slices are closely packed on a white background. The structural formula with this picture shows a central chain of five C atoms. The leftmost C atom has an O atom double bonded above and to the left and a singly bonded O atom below and to the left. This single bonded O atom has an H atom indicated in red on its left side which is highlighted in pink. The second C atom moving to the right has H atoms bonded above and below. The third C atom has a single bonded O atom above which has an H atom on its right. This third C atom has a C atom bonded below it which has an O atom double bonded below and to the left and a singly bonded O atom below and to the right. An H atom appears in red and is highlighted in pink to the right of the singly bonded O atom. The fourth C atom has H atoms bonded above and below. The fifth C atom is at the right end of the structure. It has an O atom double bonded above and to the right and a singly bonded O atom below and to the right. This single bonded O atom has a red H atom on its right side which is highlighted in pink. The second image is a photograph of bottles of vinegar. The bottles are labeled, “Balsamic Vinegar,” and appear to be clear and colorless. The liquid in this bottle appears to be brown. The structural formula that appears with this image shows a chain of two C atoms. The leftmost C atom has H atoms bonded above, below, and to the left. The C atom on the right has a doubly bonded O atom above and to the right and a singly bonded O atom below and to the right. This O atom has an H atom bonded to its right which is highlighted in pink.

Table **4.3.2**: Common Strong Acids

Compound Formula	Name in Aqueous Solution
HBr	hydrobromic acid
HCl	hydrochloric acid
HI	hydroiodic acid
HNO_3	nitric acid
$HClO_4$	perchloric acid
H_2SO_4	sulfuric acid

A base is a substance that will dissolve in water to yield hydroxide ions, OH^-. The most common bases are ionic compounds composed of alkali or alkaline earth metal cations (groups 1 and 2) combined with the hydroxide ion—for example, NaOH and $Ca(OH)_2$. When these compounds dissolve in water, hydroxide ions are released directly into the solution. For example, KOH and $Ba(OH)_2$ dissolve in water and dissociate completely to produce cations (K^+ and Ba^{2+}, respectively) and hydroxide ions, OH^-. These bases, along with other hydroxides that completely dissociate in water, are considered strong bases.

Consider as an example the dissolution of lye (sodium hydroxide) in water:

$$\mathrm{NaOH}(s) \rightarrow \mathrm{Na}^+(aq) + \mathrm{OH}^-(aq)$$

This equation confirms that sodium hydroxide is a base. When dissolved in water, NaOH dissociates to yield Na^+ and OH^- ions. This is also true for any other ionic compound containing hydroxide ions. Since the dissociation process is essentially complete

when ionic compounds dissolve in water under typical conditions, NaOH and other ionic hydroxides are all classified as strong bases.

Unlike ionic hydroxides, some compounds produce hydroxide ions when dissolved by chemically reacting with water molecules. In all cases, these compounds react only partially and so are classified as weak bases. These types of compounds are also abundant in nature and important commodities in various technologies. For example, global production of the weak base ammonia is typically well over 100 metric tons annually, being widely used as an agricultural fertilizer, a raw material for chemical synthesis of other compounds, and an active ingredient in household cleaners (Figure **4.3.4**). When dissolved in water, ammonia reacts partially to yield hydroxide ions, as shown here:

$$\mathrm{NH_3}(aq) + \mathrm{H_2O}(l) \rightleftharpoons \mathrm{NH_4^+}(aq) + \mathrm{OH^-}(aq)$$

This is, by definition, an acid-base reaction, in this case involving the transfer of H^+ ions from water molecules to ammonia molecules. Under typical conditions, only about 1% of the dissolved ammonia is present as $\mathrm{NH_4^+}$ ions.

(a) (b)

Figure **4.3.4**: Ammonia is a weak base used in a variety of applications. (a) Pure ammonia is commonly applied as an agricultural fertilizer. (b) Dilute solutions of ammonia are effective household cleansers. (credit a: modification of work by National Resources Conservation Service; credit b: modification of work by pat00139)

This photograph shows a large agricultural tractor in a field pulling a field sprayer and a large, white cylindrical tank which is labeled “Caution Ammonia.”

The chemical reactions described in which acids and bases dissolved in water produce hydronium and hydroxide ions, respectively, are, by definition, acid-base reactions. In these reactions, water serves as both a solvent *and* a reactant. A neutralization reaction is a specific type of acid-base reaction in which the reactants are an acid and a base, the products are often a salt and water, and neither reactant is the water itself:

$$\mathrm{acid} + \mathrm{base} \rightarrow \mathrm{salt} + \mathrm{water}$$

To illustrate a neutralization reaction, consider what happens when a typical antacid such as milk of magnesia (an aqueous suspension of solid $Mg(OH)_2$) is ingested to ease symptoms associated with excess stomach acid (HCl):

$$\mathrm{Mg(OH)_2}(s) + 2\,\mathrm{HCl}(aq) \rightarrow \mathrm{MgCl_2}(aq) + 2\,\mathrm{H_2O}(l).$$

Note that in addition to water, this reaction produces a salt, magnesium chloride.

✔ Example **4.3.2**: Writing Equations for Acid-Base Reactions

Write balanced chemical equations for the acid-base reactions described here:

a. the weak acid hydrogen hypochlorite reacts with water
b. a solution of barium hydroxide is neutralized with a solution of nitric acid

Solution

(a) The two reactants are provided, HOCl and H_2O. Since the substance is reported to be an acid, its reaction with water will involve the transfer of H^+ from HOCl to H_2O to generate hydronium ions, H_3O^+ and hypochlorite ions, OCl^-.

$$\mathrm{HOCl}(aq) + \mathrm{H_2O}(l) \rightleftharpoons \mathrm{OCl^-}(aq) + \mathrm{H_3O^+}(aq)$$

A double-arrow is appropriate in this equation because it indicates the HOCl is a weak acid that has not reacted completely.

(b) The two reactants are provided, $Ba(OH)_2$ and HNO_3. Since this is a neutralization reaction, the two products will be water and a salt composed of the cation of the ionic hydroxide (Ba^{2+}) and the anion generated when the acid transfers its hydrogen ion (NO_3^-).

$$Ba(OH)_2(aq) + 2\,HNO_3(aq) \rightarrow Ba(NO_3)_2(aq) + 2\,H_2O(l)$$

? Exercise 4.3.21

Write the net ionic equation representing the neutralization of any strong acid with an ionic hydroxide. (Hint: Consider the ions produced when a strong acid is dissolved in water.)

Answer

$$H_3O^+(aq) + OH^-(aq) \rightarrow 2\,H_2O(l)$$

Explore the microscopic view of strong and weak acids and bases.

Oxidation-Reduction Reactions

Earth's atmosphere contains about 20% molecular oxygen, O_2, a chemically reactive gas that plays an essential role in the metabolism of aerobic organisms and in many environmental processes that shape the world. The term oxidation was originally used to describe chemical reactions involving O_2, but its meaning has evolved to refer to a broad and important reaction class known as *oxidation-reduction (redox) reactions*. A few examples of such reactions will be used to develop a clear picture of this classification.

Some redox reactions involve the transfer of electrons between reactant species to yield ionic products, such as the reaction between sodium and chlorine to yield sodium chloride:

$$2\,Na(s) + Cl_2(g) \rightarrow 2\,NaCl(s)$$

It is helpful to view the process with regard to each individual reactant, that is, to represent the fate of each reactant in the form of an equation called a half-reaction:

$$2\,Na(s) \rightarrow 2\,Na^+(s) + 2\,e^-$$
$$Cl_2(g) + 2\,e^- \rightarrow 2\,Cl^-(s)$$

These equations show that Na atoms *lose electrons* while Cl atoms (in the Cl_2 molecule) *gain electrons*, the "s" subscripts for the resulting ions signifying they are present in the form of a solid ionic compound. For redox reactions of this sort, the loss and gain of electrons define the complementary processes that occur:

oxidation = loss of electrons (4.3.1)
reduction = gain of electrons (4.3.2)

In this reaction, then, sodium is *oxidized* and chlorine undergoes reduction. Viewed from a more active perspective, sodium functions as a reducing agent (reductant), since it provides electrons to (or reduces) chlorine. Likewise, chlorine functions as an oxidizing agent (oxidant), as it effectively removes electrons from (oxidizes) sodium.

reducing agent = species that is oxidized (4.3.3)
oxidizing agent = species that is reduced (4.3.4)

Some redox processes, however, do not involve the transfer of electrons. Consider, for example, a reaction similar to the one yielding NaCl:

$$H_2(g) + Cl_2(g) \rightarrow 2\,HCl(g)$$

The product of this reaction is a covalent compound, so transfer of electrons in the explicit sense is not involved. To clarify the similarity of this reaction to the previous one and permit an unambiguous definition of redox reactions, a property called *oxidation number* has been defined. The oxidation number (or oxidation state) of an element in a compound is the charge its atoms would possess *if the compound was ionic*. The following guidelines are used to assign oxidation numbers to each element in a molecule or ion.

1. The oxidation number of an atom in an elemental substance is zero.
2. The oxidation number of a monatomic ion is equal to the ion's charge.
3. Oxidation numbers for common nonmetals are usually assigned as follows:
   - Hydrogen: +1 when combined with nonmetals, −1 when combined with metals
   - Oxygen: −2 in most compounds, sometimes −1 (so-called peroxides, O_2^{2-}), very rarely $-\frac{1}{2}$ (so-called superoxides, O_2^-), positive values when combined with F (values vary)
   - Halogens: −1 for F always, −1 for other halogens except when combined with oxygen or other halogens (positive oxidation numbers in these cases, varying values)
4. The sum of oxidation numbers for all atoms in a molecule or polyatomic ion equals the charge on the molecule or ion.

Note: The proper convention for reporting charge is to write the number first, followed by the sign (e.g., 2+), while oxidation number is written with the reversed sequence, sign followed by number (e.g., +2). This convention aims to emphasize the distinction between these two related properties.

Example 4.3.3: Assigning Oxidation Numbers

Follow the guidelines in this section of the text to assign oxidation numbers to all the elements in the following species:

a. H_2S
b. SO_3^{2-}
c. Na_2SO_4

Solution

(a) According to guideline 1, the oxidation number for H is +1.

Using this oxidation number and the compound's formula, guideline 4 may then be used to calculate the oxidation number for sulfur:

$$\text{charge on } H_2S = 0 = (2 \times +1) + (1 \times x)$$

$$x = 0 - (2 \times +1) = -2$$

(b) Guideline 3 suggests the oxidation number for oxygen is −2.

Using this oxidation number and the ion's formula, guideline 4 may then be used to calculate the oxidation number for sulfur:

$$\text{charge on } SO_3^{2-} = -2 = (3 \times -2) + (1 \times x)$$

$$x = -2 - (3 \times -2) = +4$$

(c) For ionic compounds, it's convenient to assign oxidation numbers for the cation and anion separately.

According to guideline 2, the oxidation number for sodium is +1.

Assuming the usual oxidation number for oxygen (−2 per guideline 3), the oxidation number for sulfur is calculated as directed by guideline 4:

$$\text{charge on } SO_4^{2-} = -2 = (4 \times -2) + (1 \times x)$$

$$x = -2 - (4 \times -2) = +6$$

Exercise 4.3.3

Assign oxidation states to the elements whose atoms are underlined in each of the following compounds or ions:

a. $K\underline{N}O_3$
b. $\underline{Al}H_3$
c. $\underline{N}H_4^+$
d. msubsup

Answer a

N, +5

Answer b

Al, +3

Answer c

N, −3

Answer d

P, +5

Using the oxidation number concept, an all-inclusive definition of redox reaction has been established. Oxidation-reduction (redox) reactions are those in which one or more elements involved undergo a change in oxidation number. While the vast majority of redox reactions involve changes in oxidation number for two or more elements, a few interesting exceptions to this rule do exist as shown below\). Definitions for the complementary processes of this reaction class are correspondingly revised as shown here:

$$\textbf{oxidation} = \textbf{increase in oxidation number} \tag{4.3.5}$$

$$\textbf{reduction} = \textbf{decrease in oxidation number} \tag{4.3.6}$$

Returning to the reactions used to introduce this topic, they may now both be identified as redox processes. In the reaction between sodium and chlorine to yield sodium chloride, sodium is oxidized (its oxidation number increases from 0 in Na to +1 in NaCl) and chlorine is reduced (its oxidation number decreases from 0 in Cl_2 to −1 in NaCl). In the reaction between molecular hydrogen and chlorine, hydrogen is oxidized (its oxidation number increases from 0 in H_2 to +1 in HCl) and chlorine is reduced (its oxidation number decreases from 0 in Cl_2 to −1 in HCl).

Several subclasses of redox reactions are recognized, including combustion reactions in which the reductant (also called a *fuel*) and oxidant (often, but not necessarily, molecular oxygen) react vigorously and produce significant amounts of heat, and often light, in the form of a flame. Solid rocket-fuel reactions such as the one depicted below are combustion processes. A typical propellant reaction in which solid aluminum is oxidized by ammonium perchlorate is represented by this equation:

$$10\,Al(s) + 6\,NH_4ClO_4(s) \rightarrow 4\,Al_2O_3(s) + 2\,AlCl_3(s) + 12\,H_2O(g) + 3\,N_2(g)$$

Watch a brief video showing the test firing of a small-scale, prototype, hybrid rocket engine planned for use in the new Space Launch System being developed by NASA. The first engines firing at 3 s (green flame) use a liquid fuel/oxidant mixture, and the second, more powerful engines firing at 4 s (yellow flame) use a solid mixture.

Single-displacement (replacement) reactions are redox reactions in which an ion in solution is displaced (or replaced) via the oxidation of a metallic element. One common example of this type of reaction is the acid oxidation of certain metals:

$$Zn(s) + 2\,HCl(aq) \rightarrow ZnCl_2(aq) + H_2(g)$$

Metallic elements may also be oxidized by solutions of other metal salts; for example:

$$\mathrm{Cu}(s)+2\,\mathrm{AgNO_3}(aq) \rightarrow \mathrm{Cu(NO_3)_2}(aq)+2\,\mathrm{Ag}(s)$$

This reaction may be observed by placing copper wire in a solution containing a dissolved silver salt. Silver ions in solution are reduced to elemental silver at the surface of the copper wire, and the resulting Cu^{2+} ions dissolve in the solution to yield a characteristic blue color (Figure **4.3.4**).



Figure **4.3.4**: (a) A copper wire is shown next to a solution containing silver(I) ions. (b) Displacement of dissolved silver ions by copper ions results in (c) accumulation of gray-colored silver metal on the wire and development of a blue color in the solution, due to dissolved copper ions. (credit: modification of work by Mark Ott)

This figure contains three photographs. In a, a coiled copper wire is shown beside a test tube filled with a clear, colorless liquid. In b, the wire has been inserted into the test tube with the clear, colorless liquid. In c, the test tube contains a light blue liquid and the coiled wire appears to have a fuzzy silver gray coating.

✔ Example 4.3.4: Describing Redox Reactions

Identify which equations represent redox reactions, providing a name for the reaction if appropriate. For those reactions identified as redox, name the oxidant and reductant.

a. $\mathrm{ZnCO_3}(s) \rightarrow \mathrm{ZnO}(s)+\mathrm{CO_2}(g)$
b. $2\,\mathrm{Ga}(l)+3\,\mathrm{Br_2}(l) \rightarrow 2\,\mathrm{GaBr_3}(s)$
c. $2\,\mathrm{H_2O_2}(aq) \rightarrow 2\,\mathrm{H_2O}(l)+\mathrm{O_2}(g)$
d. $\mathrm{BaCl_2}(aq)+\mathrm{K_2SO_4}(aq) \rightarrow \mathrm{BaSO_4}(s)+2\,\mathrm{KCl}(aq)$
e. $\mathrm{C_2H_4}(g)+3\,\mathrm{O_2}(g) \rightarrow 2\,\mathrm{CO_2}(g)+2\,\mathrm{H_2O}(l)$

Solution

Redox reactions are identified per definition if one or more elements undergo a change in oxidation number.

a. This is not a redox reaction, since oxidation numbers remain unchanged for all elements.
b. This is a redox reaction. Gallium is oxidized, its oxidation number increasing from 0 in Ga(l) to +3 in $GaBr_3$(s). The reducing agent is Ga(l). Bromine is reduced, its oxidation number decreasing from 0 in Br_2(l) to −1 in $GaBr_3$(s). The oxidizing agent is Br_2(l).
c. This is a redox reaction. It is a particularly interesting process, as it involves the same element, oxygen, undergoing both oxidation and reduction (a so-called *disproportionation reaction)*. Oxygen is oxidized, its oxidation number increasing from −1 in H_2O_2(aq) to 0 in O_2(g). Oxygen is also reduced, its oxidation number decreasing from −1 in H_2O_2(aq) to −2 in H_2O(l). For disproportionation reactions, the same substance functions as an oxidant and a reductant.
d. This is not a redox reaction, since oxidation numbers remain unchanged for all elements.
e. This is a redox reaction (combustion). Carbon is oxidized, its oxidation number increasing from −2 in C_2H_4(g) to +4 in CO_2(g). The reducing agent (fuel) is C_2H_4(g). Oxygen is reduced, its oxidation number decreasing from 0 in O_2(g) to −2 in H_2O(l). The oxidizing agent is O_2(g).

? Exercise 4.3.4

This equation describes the production of tin(II) chloride:

$$\mathrm{Sn}(s)+2\,\mathrm{HCl}(g) \rightarrow \mathrm{SnCl_2}(s)+\mathrm{H_2}(g)$$

Is this a redox reaction? If so, provide a more specific name for the reaction if appropriate, and identify the oxidant and reductant.

Answer

Yes, a single-replacement reaction. Sn(*s*) is the reductant, HCl(*g*) is the oxidant.

Balancing Redox Reactions via the Half-Reaction Method

Redox reactions that take place in aqueous media often involve water, hydronium ions, and hydroxide ions as reactants or products. Although these species are not oxidized or reduced, they do participate in chemical change in other ways (e.g., by providing the elements required to form oxyanions). Equations representing these reactions are sometimes very difficult to balance by inspection, so systematic approaches have been developed to assist in the process. One very useful approach is to use the method of half-reactions, which involves the following steps:

1. Write the two half-reactions representing the redox process.
2. Balance all elements except oxygen and hydrogen.
3. Balance oxygen atoms by adding H_2O molecules.
4. Balance hydrogen atoms by adding H^+ ions.
5. Balance charge[1] by adding electrons.
6. If necessary, multiply each half-reaction's coefficients by the smallest possible integers to yield equal numbers of electrons in each.
7. Add the balanced half-reactions together and simplify by removing species that appear on both sides of the equation.
8. For reactions occurring in basic media (excess hydroxide ions), carry out these additional steps:
   - Add OH^- ions to both sides of the equation in numbers equal to the number of H^+ ions.
   - On the side of the equation containing both H^+ and OH^- ions, combine these ions to yield water molecules.
   - Simplify the equation by removing any redundant water molecules.
9. Finally, check to see that both the number of atoms and the total charges[2] are balanced.

Example 4.3.5: Balancing Redox Reactions in Acidic Solution

Write a balanced equation for the reaction between dichromate ion and iron(II) to yield iron(III) and chromium(III) in acidic solution.

$$\mathrm{Cr_2O_7^{2-} + Fe^{2+} \rightarrow Cr^{3+} + Fe^{3+}}$$

Solution

Write the two half-reactions.

Each half-reaction will contain one reactant and one product with one element in common.

$$\mathrm{Fe^{2+} \rightarrow Fe^{3+}}$$
$$\mathrm{Cr_2O_7^{2-} \rightarrow Cr^{3+}}$$

Balance all elements except oxygen and hydrogen. The iron half-reaction is already balanced, but the chromium half-reaction shows two Cr atoms on the left and one Cr atom on the right. Changing the coefficient on the right side of the equation to 2 achieves balance with regard to Cr atoms.

$$\mathrm{Fe^{2+} \rightarrow Fe^{3+}}$$
$$\mathrm{Cr_2O_7^{2-} \rightarrow 2\,Cr^{3+}}$$

Balance oxygen atoms by adding H_2O *molecules*. The iron half-reaction does not contain O atoms. The chromium half-reaction shows seven O atoms on the left and none on the right, so seven water molecules are added to the right side.

$$\mathrm{Fe^{2+} \rightarrow Fe^{3+}}$$
$$\mathrm{Cr_2O_7^{2-} \rightarrow 2\,Cr^{3+} + 7\,H_2O}$$

Balance hydrogen atoms by adding H^+*ions*. The iron half-reaction does not contain H atoms. The chromium half-reaction shows 14 H atoms on the right and none on the left, so 14 hydrogen ions are added to the left side.

$$\mathrm{Fe^{2+} \rightarrow Fe^{3+}}$$
$$\mathrm{Cr_2O_7^{2-} + 14\,H^+ \rightarrow 2\,Cr^{3+} + 7\,H_2O}$$

Balance charge by adding electrons. The iron half-reaction shows a total charge of 2+ on the left side (1 Fe^{2+} ion) and 3+ on the right side (1 Fe^{3+} ion). Adding one electron to the right side bring that side's total charge to (3+) + (1−) = 2+, and charge balance is achieved.

The chromium half-reaction shows a total charge of (1 × 2−) + (14 × 1+) = 12+ on the left side ($1\,Cr_2O_7^{2-}$ ion and 14 H^+ ions). The total charge on the right side is (2 × 3+) = 6 + (2 Cr^{3+} ions). Adding six electrons to the left side will bring that side's total charge to (12+ + 6−) = 6+, and charge balance is achieved.

$$\mathrm{Fe^{2+} \rightarrow Fe^{3+} + e^-}$$
$$\mathrm{Cr_2O_7^{2-} + 14\,H^+ + 6\,e^- \rightarrow 2\,Cr^{3+} + 7\,H_2O}$$

Multiply the two half-reactions so the number of electrons in one reaction equals the number of electrons in the other reaction. To be consistent with mass conservation, and the idea that redox reactions involve the transfer (not creation or destruction) of electrons, the iron half-reaction's coefficient must be multiplied by 6.

$$\mathrm{6\,Fe^{2+} \rightarrow 6\,Fe^{3+} + 6\,e^-}$$
$$\mathrm{Cr_2O_7^{2-} + 6\,e^- + 14\,H^+ \rightarrow 2\,Cr^{3+} + 7\,H_2O}$$

Add the balanced half-reactions and cancel species that appear on both sides of the equation.

$$\mathrm{6\,Fe^{2+} + Cr_2O_7^{2-} + 6\,e^- + 14\,H^+ \rightarrow 6\,Fe^{3+} + 6\,e^- + 2\,Cr^{3+} + 7\,H_2O}$$

Only the six electrons are redundant species. Removing them from each side of the equation yields the simplified, balanced equation here:

$$\mathrm{6\,Fe^{2+} + Cr_2O_7^{2-} + 14\,H^+ \rightarrow 6\,Fe^{3+} + 2\,Cr^{3+} + 7\,H_2O}$$

A final check of atom and charge balance confirms the equation is balanced.

Final check of atom and charge balance confirms the equation is balanced.

	Reactants	Products
Fe	6	6
Cr	2	2
O	7	7
H	14	14
charge	24+	24+

? Exercise 4.3.5

In acidic solution, hydrogen peroxide reacts with Fe^{2+} to produce Fe^{3+} and H_2O. Write a balanced equation for this reaction.

Answer

$$\mathrm{H_2O_2}(aq) + 2\,\mathrm{H^+}(aq) + 2\,\mathrm{Fe^{2+}} \rightarrow 2\,\mathrm{H_2O}(l) + 2\,\mathrm{Fe^{3+}}$$

Summary

Chemical reactions are classified according to similar patterns of behavior. A large number of important reactions are included in three categories: precipitation, acid-base, and oxidation-reduction (redox). Precipitation reactions involve the formation of one or more insoluble products. Acid-base reactions involve the transfer of hydrogen ions between reactants. Redox reactions involve a change in oxidation number for one or more reactant elements. Writing balanced equations for some redox reactions that occur in aqueous solutions is simplified by using a systematic approach called the half-reaction method.

Footnotes

1. 1 The requirement of “charge balance” is just a specific type of “mass balance” in which the species in question are electrons. An equation must represent equal numbers of electrons on the reactant and product sides, and so both atoms and charges must be balanced.
2. 2 The requirement of “charge balance” is just a specific type of “mass balance” in which the species in question are electrons. An equation must represent equal numbers of electrons on the reactant and product sides, and so both atoms and charges must be balanced.

Glossary

acid

substance that produces H_3O^+ when dissolved in water

acid-base reaction

reaction involving the transfer of a hydrogen ion between reactant species

base

substance that produces OH^- when dissolved in water

combustion reaction

vigorous redox reaction producing significant amounts of energy in the form of heat and, sometimes, light

half-reaction

an equation that shows whether each reactant loses or gains electrons in a reaction.

insoluble

of relatively low solubility; dissolving only to a slight extent

neutralization reaction

reaction between an acid and a base to produce salt and water

oxidation

process in which an element’s oxidation number is increased by loss of electrons

oxidation-reduction reaction

(also, redox reaction) reaction involving a change in oxidation number for one or more reactant elements

oxidation number

(also, oxidation state) the charge each atom of an element would have in a compound if the compound were ionic

oxidizing agent

(also, oxidant) substance that brings about the oxidation of another substance, and in the process becomes reduced

precipitate

insoluble product that forms from reaction of soluble reactants

precipitation reaction

reaction that produces one or more insoluble products; when reactants are ionic compounds, sometimes called double-displacement or metathesis

reduction
process in which an element's oxidation number is decreased by gain of electrons

reducing agent
(also, reductant) substance that brings about the reduction of another substance, and in the process becomes oxidized

salt
ionic compound that can be formed by the reaction of an acid with a base that contains a cation and an anion other than hydroxide or oxide

single-displacement reaction
(also, replacement) redox reaction involving the oxidation of an elemental substance by an ionic species

soluble
of relatively high solubility; dissolving to a relatively large extent

solubility
the extent to which a substance may be dissolved in water, or any solvent

strong acid
acid that reacts completely when dissolved in water to yield hydronium ions

strong base
base that reacts completely when dissolved in water to yield hydroxide ions

weak acid
acid that reacts only to a slight extent when dissolved in water to yield hydronium ions

weak base
base that reacts only to a slight extent when dissolved in water to yield hydroxide ions

---

This page titled 4.3: Classifying Chemical Reactions is shared under a CC BY license and was authored, remixed, and/or curated by OpenStax.

- **4.3: Classifying Chemical Reactions** is licensed CC BY 4.0.

4.4: Reaction Stoichiometry

Learning Objectives

- Explain the concept of stoichiometry as it pertains to chemical reactions
- Use balanced chemical equations to derive stoichiometric factors relating amounts of reactants and products
- Perform stoichiometric calculations involving mass, moles, and solution molarity

A balanced chemical equation provides a great deal of information in a very succinct format. Chemical formulas provide the identities of the reactants and products involved in the chemical change, allowing classification of the reaction. Coefficients provide the relative numbers of these chemical species, allowing a quantitative assessment of the relationships between the amounts of substances consumed and produced by the reaction. These quantitative relationships are known as the reaction's stoichiometry, a term derived from the Greek words *stoicheion* (meaning "element") and *metron* (meaning "measure"). In this module, the use of balanced chemical equations for various stoichiometric applications is explored.

The general approach to using stoichiometric relationships is similar in concept to the way people go about many common activities. Cooking, for example, offers an appropriate comparison. Suppose a recipe for making eight pancakes calls for 1 cup pancake mix, $\frac{3}{4}$ cup milk, and one egg. The "equation" representing the preparation of pancakes per this recipe is

$$\mathrm{1\ cup\ mix} + \frac{3}{4}\ \mathrm{cup\ milk} + \mathrm{1\ egg} \rightarrow \mathrm{8\ pancakes} \tag{4.4.1}$$

If two dozen pancakes are needed for a big family breakfast, the ingredient amounts must be increased proportionally according to the amounts given in the recipe. For example, the number of eggs required to make 24 pancakes is

$$24\ \cancel{\mathrm{pancakes}} \times \frac{1\ \mathrm{egg}}{8\ \cancel{\mathrm{pancakes}}} = 3\ \mathrm{eggs} \tag{4.4.2}$$

Balanced chemical equations are used in much the same fashion to determine the amount of one reactant required to react with a given amount of another reactant, or to yield a given amount of product, and so forth. The coefficients in the balanced equation are used to derive stoichiometric factors that permit computation of the desired quantity. To illustrate this idea, consider the production of ammonia by reaction of hydrogen and nitrogen:

$$\mathrm{N_2}(g) + 3\,\mathrm{H_2}(g) \rightarrow 2\,\mathrm{NH_3}(g) \tag{4.4.3}$$

This equation shows that ammonia molecules are produced from hydrogen molecules in a 2:3 ratio, and stoichiometric factors may be derived using any amount (number) unit:

$$\frac{2\,NH3\ molecules}{3H2\ molecules} \text{ or } \frac{2\ doz\ NH3\ molecules}{3\ doz\ H2\ molecules} \text{ or } \frac{2\ mol\ NH3\ molecules}{3\ mol\ H2\ molecules} \tag{4.4.4}$$

These stoichiometric factors can be used to compute the number of ammonia molecules produced from a given number of hydrogen molecules, or the number of hydrogen molecules required to produce a given number of ammonia molecules. Similar factors may be derived for any pair of substances in any chemical equation.

Example 4.4.1: Moles of Reactant Required in a Reaction

How many moles of I_2 are required to react with 0.429 mol of Al according to the following equation (see Figure 4.4.2)?

$$2\,\mathrm{Al} + 3\,\mathrm{I_2} \rightarrow 2\,\mathrm{AlI_3} \tag{4.4.5}$$



Figure 4.4.1: Aluminum and iodine react to produce aluminum iodide. The heat of the reaction vaporizes some of the solid iodine as a purple vapor. (credit: modification of work by Mark Ott)

Three pictures showing the progression of the reaction between iodine and aluminum. The first diagram shows only a pile of silver powder while the second diagram shows small amount of vapor forming. The final picture shows a large release of purple vapor.

Solution

Referring to the balanced chemical equation, the stoichiometric factor relating the two substances of interest is $\frac{3\ mol\ I2}{2\ mol\ Al}$. The molar amount of iodine is derived by multiplying the provided molar amount of aluminum by this factor:

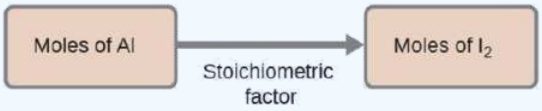

$$\text{mol I}_2 = 0.429\ \cancel{\text{mol Al}} \times \frac{3\ \text{mol I}_2}{2\ \cancel{\text{mol Al}}}$$

$$= 0.644\ \text{mol I}_2$$

Exercise 4.4.1

How many moles of $Ca(OH)_2$ are required to react with 1.36 mol of H_3PO_4 to produce $Ca_3(PO_4)_2$ according to the equation $3\,Ca(OH)_2 + 2\,H_3PO_4 \rightarrow Ca_3(PO_4)_2 + 6\,H_2O$?

Answer

2.04 mol

Example 4.4.2: Number of Product Molecules Generated by a Reaction

How many carbon dioxide molecules are produced when 0.75 mol of propane is combusted according to this equation?

$$C_3H_8 + 5\,O_2 \rightarrow 3\,CO_2 + 4\,H_2O \tag{4.4.6}$$

Solution

The approach here is the same as for Example 4.4.1, though the absolute number of molecules is requested, not the number of moles of molecules. This will simply require use of the moles-to-numbers conversion factor, Avogadro's number.

The balanced equation shows that carbon dioxide is produced from propane in a 3:1 ratio:

\[\ce{\dfrac{3\: mol\: CO2}{1\: mol\: C3H8}} \label{4.4.7} \]

Using this stoichiometric factor, the provided molar amount of propane, and Avogadro's number,

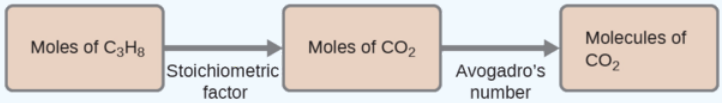

$$0.75\ \cancel{\text{mol C}_3\text{H}_8} \times \frac{3\ \cancel{\text{mol CO}_2}}{1\ \cancel{\text{mol C}_3\text{H}_8}} \times \frac{6.022 \times 10^{23}\ \text{CO}_2\ \text{molecules}}{\cancel{\text{mol CO}_2}} \tag{4.4.7}$$

$$= 1.4 \times 10^{24}\ \text{CO}_2\ \text{molecules}$$

https://chem.libretexts.org/@go/page/162460

Exercise 4.4.1

How many NH_3 molecules are produced by the reaction of 4.0 mol of $Ca(OH)_2$ according to the following equation:

$$(NH_4)_2SO_4 + Ca(OH)_2 \rightarrow 2\,NH_3 + CaSO_4 + 2\,H_2O \tag{4.4.8}$$

Answer

4.8×10^{24} NH_3 molecules

These examples illustrate the ease with which the amounts of substances involved in a chemical reaction of known stoichiometry may be related. Directly measuring numbers of atoms and molecules is, however, not an easy task, and the practical application of stoichiometry requires that we use the more readily measured property of mass.

Example 4.4.3: Relating Masses of Reactants and Products

What mass of sodium hydroxide, NaOH, would be required to produce 16 g of the antacid milk of magnesia [magnesium hydroxide, $Mg(OH)_2$] by the following reaction?

$$MgCl_2(aq) + 2\,NaOH(aq) \rightarrow Mg(OH)_2(s) + 2\,NaCl(aq)$$

Solution

The approach used previously in Examples **4.4.1** and **4.4.2** is likewise used here; that is, we must derive an appropriate stoichiometric factor from the balanced chemical equation and use it to relate the amounts of the two substances of interest. In this case, however, masses (not molar amounts) are provided and requested, so additional steps of the sort learned in the previous chapter are required. The calculations required are outlined in this flowchart:

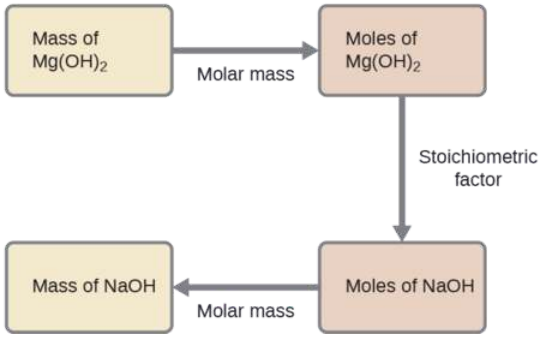

$$16\ \cancel{g\ Mg(OH)_2} \times \frac{1\ \cancel{mol\ Mg(OH)_2}}{58.3\ \cancel{g\ Mg(OH)_2}} \times \frac{2\ \cancel{mol\ NaOH}}{1\ \cancel{mol\ Mg(OH)_2}} \times \frac{40.0\ g\ NaOH}{\cancel{mol\ NaOH}} = 22\ g\ NaOH$$

Exercise 4.4.3

What mass of gallium oxide, Ga_2O_3, can be prepared from 29.0 g of gallium metal? The equation for the reaction is $4\,Ga + 3\,O_2 \rightarrow 2\,Ga_2O_3$.

Answer

39.0 g

Example 4.4.4: Relating Masses of Reactants

What mass of oxygen gas, O_2, from the air is consumed in the combustion of 702 g of octane, C_8H_{18}, one of the principal components of gasoline?

$$2\,C_8H_{18} + 25\,O_2 \rightarrow 16\,CO_2 + 18\,H_2O$$

Solution

The approach required here is the same as for the Example **4.4.3**, differing only in that the provided and requested masses are both for reactant species.

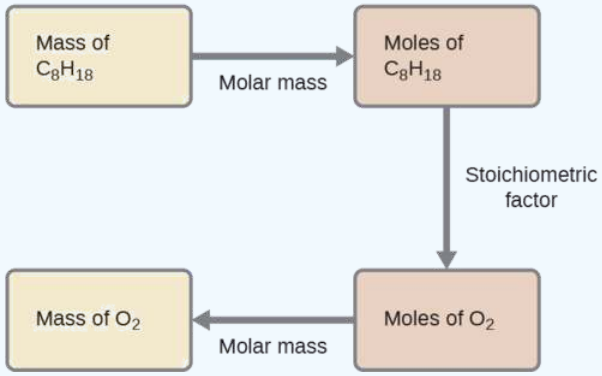

$$702\ \cancel{\text{g C}_8\text{H}_{18}} \times \frac{1\ \cancel{\text{mol C}_8\text{H}_{18}}}{114.23\ \cancel{\text{g C}_8\text{H}_{18}}} \times \frac{25\ \cancel{\text{mol O}_2}}{2\ \cancel{\text{mol C}_8\text{H}_{18}}} \times \frac{32.00\ \text{g O}_2}{\cancel{\text{mol O}_2}} = 2.46 \times 10^3\ \text{g O}_2$$

? Exercise 4.4.4

What mass of CO is required to react with 25.13 g of Fe_2O_3 according to the equation $\mathbf{Fe_2O_3 + 3\,CO \rightarrow 2\,Fe + 3\,CO_2}$?

Answer

13.22 g

These examples illustrate just a few instances of reaction stoichiometry calculations. Numerous variations on the beginning and ending computational steps are possible depending upon what particular quantities are provided and sought (volumes, solution concentrations, and so forth). Regardless of the details, all these calculations share a common essential component: the use of stoichiometric factors derived from balanced chemical equations. Figure **4.4.2** provides a general outline of the various computational steps associated with many reaction stoichiometry calculations.

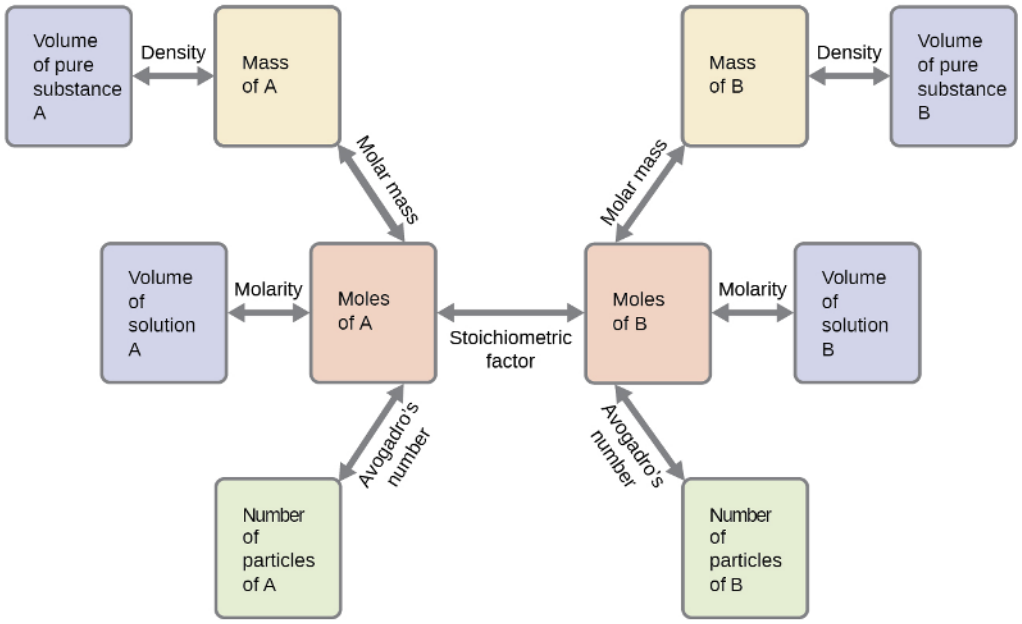

Figure **4.4.2**: The flowchart depicts the various computational steps involved in most reaction stoichiometry calculations.

Schematic flowchart showing how density is used for converting volume of pure substance to mass, molar mass for mass and moles, molarity for moles and volume of solution, Avogadro's number for moles and number of particles, and stoichiometric factor for relating moles of one substance to another.

Airbags

Airbags (Figure **4.4.3**) are a safety feature provided in most automobiles since the 1990s. The effective operation of an airbag requires that it be rapidly inflated with an appropriate amount (volume) of gas when the vehicle is involved in a collision. This requirement is satisfied in many automotive airbag systems through use of explosive chemical reactions, one common choice being the decomposition of sodium azide, NaN_3. When sensors in the vehicle detect a collision, an electrical current is passed through a carefully measured amount of NaN_3 to initiate its decomposition:

$$\mathbf{2\,NaN_3}(s) \rightarrow \mathbf{3\,N_2}(g) + \mathbf{2\,Na}(s)$$

This reaction is very rapid, generating gaseous nitrogen that can deploy and fully inflate a typical airbag in a fraction of a second (~0.03–0.1 s). Among many engineering considerations, the amount of sodium azide used must be appropriate for generating enough nitrogen gas to fully inflate the air bag and ensure its proper function. For example, a small mass (~100 g) of NaN_3 will generate approximately 50 L of N_2.

Figure **4.4.3**: Airbags deploy upon impact to minimize serious injuries to passengers. (credit: Jon Seidman)

Summary

A balanced chemical equation may be used to describe a reaction's stoichiometry (the relationships between amounts of reactants and products). Coefficients from the equation are used to derive stoichiometric factors that subsequently may be used for computations relating reactant and product masses, molar amounts, and other quantitative properties.

Glossary

stoichiometric factor

ratio of coefficients in a balanced chemical equation, used in computations relating amounts of reactants and products

stoichiometry

relationships between the amounts of reactants and products of a chemical reaction

---

This page titled 4.4: Reaction Stoichiometry is shared under a CC BY license and was authored, remixed, and/or curated by OpenStax.

- **4.4: Reaction Stoichiometry** by OpenStax is licensed CC BY 4.0. Original source: https://openstax.org/details/books/chemistry-2e.

4.5: Reaction Yields

Learning Objectives

- Explain the concepts of theoretical yield and limiting reactants/reagents.
- Derive the theoretical yield for a reaction under specified conditions.
- Calculate the percent yield for a reaction.

The relative amounts of reactants and products represented in a balanced chemical equation are often referred to as *stoichiometric amounts*. All the exercises of the preceding module involved stoichiometric amounts of reactants. For example, when calculating the amount of product generated from a given amount of reactant, it was assumed that any other reactants required were available in stoichiometric amounts (or greater). In this module, more realistic situations are considered, in which reactants are not present in stoichiometric amounts.

Limiting Reactant

Consider another food analogy, making grilled cheese sandwiches (Figure 4.5.1):

$$\text{1 slice of cheese} + \text{2 slices of bread} \rightarrow \text{1 sandwich} \tag{4.5.1}$$

Stoichiometric amounts of sandwich ingredients for this recipe are bread and cheese slices in a 2:1 ratio. Provided with 28 slices of bread and 11 slices of cheese, one may prepare 11 sandwiches per the provided recipe, using all the provided cheese and having six slices of bread left over. In this scenario, the number of sandwiches prepared has been *limited* by the number of cheese slices, and the bread slices have been provided in *excess*.

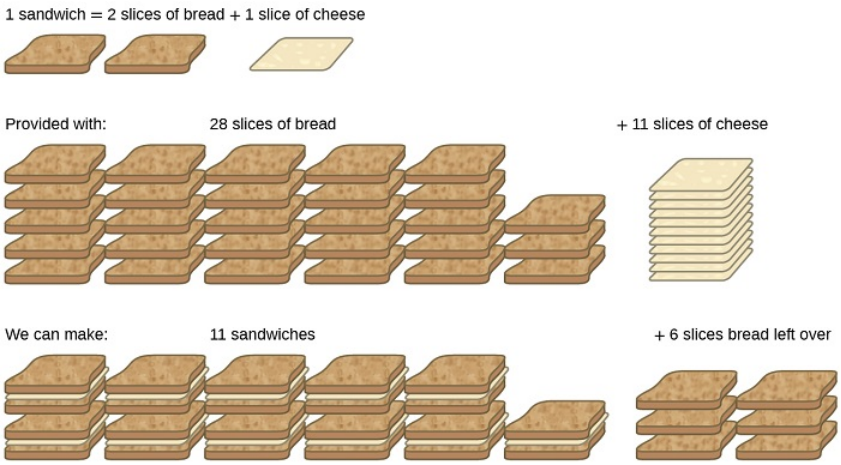

Figure 4.5.1: Sandwich making can illustrate the concepts of limiting and excess reactants.

This figure has three rows showing the ingredients needed to make a sandwich. The first row reads, “1 sandwich = 2 slices of bread + 1 slice of cheese.” Two slices of bread and one slice of cheese are shown. The second row reads, “Provided with: 28 slices of bread + 11 slices of cheese.” There are 28 slices of bread and 11 slices of cheese shown. The third row reads, “We can make: 11 sandwiches + 6 slices of bread left over.” 11 sandwiches are shown with six extra slices of bread.

Consider this concept now with regard to a chemical process, the reaction of hydrogen with chlorine to yield hydrogen chloride:

$$\mathrm{H_2}(g) + \mathrm{Cl_2}(g) \rightarrow 2\,\mathrm{HCl}(g)$$

The balanced equation shows the hydrogen and chlorine react in a 1:1 stoichiometric ratio. If these reactants are provided in any other amounts, one of the reactants will nearly always be entirely consumed, thus limiting the amount of product that may be generated. This substance is the limiting reactant, and the other substance is the excess reactant. Identifying the limiting and excess reactants for a given situation requires computing the molar amounts of each reactant provided and comparing them to the stoichiometric amounts represented in the balanced chemical equation.

For example, imagine combining 6 moles of H_2 and 4 moles of Cl_2. Identifying the limiting reactant involves comparing the amount of product expected for the complete reaction of each reactant. Each reactant amount is used to separately calculate the

amount of product that would be formed per the reaction's stoichiometry. The reactant yielding the lesser amount of product is the limiting reactant.

For the example in the previous paragraph, the complete reaction of the hydrogen would yield

$$\text{mol HCl produced} = 6\ \text{mol } H_2 \times \frac{2\ \text{mol HCl}}{1\ \text{mol } H_2} = 12\ \text{mol HCl}$$

The complete reaction of the provided chlorine would produce

$$\text{mol HCl produced} = 4\ \text{mol } Cl_2 \times \frac{2\ \text{mol HCl}}{1\ \text{mol } Cl_2} = 8\ \text{mol HCl}$$

The chlorine will be completely consumed once 8 moles of HCl have been produced. Since enough hydrogen was provided to yield 12 moles of HCl, there will be non-reacted hydrogen remaining once this reaction is complete. Chlorine, therefore, is the limiting reactant and hydrogen is the excess reactant (Figure 4.5.2). To determine the amount of excess reactant that remains, the amount of hydrogen consumed in the reaction can be subtracted from the starting quantity of hydrogen.

The amount of hydrogen consumed is

$$\text{mol } H_2 \text{ produced} = 8\ \text{mol HCl} \times \frac{1\ \text{mol } H_2}{2\ \text{mol HCl}} = 4\ \text{mol } H_2$$

Subtract the hydrogen consumed from the starting quantity

$$\text{mole of excess } H_2 = 6\ \text{mol } H_2 \text{ starting} - 4\ \text{mol } H_2 \text{ consumed} = 2\ \text{mol } H_2 \text{ excess}$$

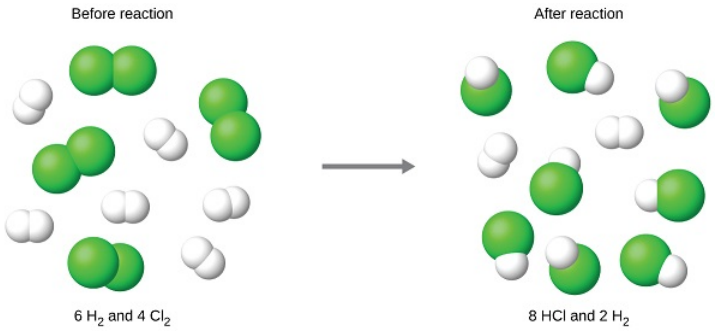

Figure 4.5.2: When H_2 and Cl_2 are combined in nonstoichiometric amounts, one of these reactants will limit the amount of HCl that can be produced. This illustration shows a reaction in which hydrogen is present in excess and chlorine is the limiting reactant.

The figure shows a space-filling molecular models reacting. There is a reaction arrow pointing to the right in the middle. To the left of the reaction arrow there are three molecules each consisting of two green spheres bonded together. There are also five molecules each consisting of two smaller, white spheres bonded together. Above these molecules is the label, "Before reaction," and below these molecules is the label, "6 H subscript 2 and 4 C l subscript 2." To the right of the reaction arrow, there are eight molecules each consisting of one green sphere bonded to a smaller white sphere. There are also two molecules each consisting of two white spheres bonded together. Above these molecules is the label, "After reaction," and below these molecules is the label, "8 H C l and 2 H subscript 2."

Example 4.5.1: Identifying the Limiting Reactant

Silicon nitride is a very hard, high-temperature-resistant ceramic used as a component of turbine blades in jet engines. It is prepared according to the following equation:

$$3\,Si(s) + 2\,N_2(g) \rightarrow Si_3N_4(s)$$

Which is the limiting reactant when 2.00 g of Si and 1.50 g of N_2 react?

Solution

Compute the provided molar amounts of reactants, and then compare these amounts to the balanced equation to identify the limiting reactant.

$$\text{mol Si} = 2.00\ \cancel{\text{g Si}} \times \frac{1\ \text{mol Si}}{28.09\ \cancel{\text{g Si}}} = 0.0712\ \text{mol Si}$$

$$\text{mol N}_2 = 1.50\ \cancel{\text{g N}_2} \times \frac{1\ \text{mol N}_2}{28.02\ \cancel{\text{g N}_2}} = 0.0535\ \text{mol N}_2$$

The provided Si:N_2 molar ratio is:

$$\frac{0.0712\ \text{mol Si}}{0.0535\ \text{mol N}_2} = \frac{1.33\ \text{mol Si}}{1\ \text{mol N}_2}$$

The stoichiometric Si:N_2 ratio is:

$$\frac{3\ \text{mol Si}}{2\ \text{mol N}_2} = \frac{1.5\ \text{mol Si}}{1\ \text{mol N}_2}$$

Comparing these ratios shows that Si is provided in a less-than-stoichiometric amount, and so is the limiting reactant.

Alternatively, compute the amount of product expected for complete reaction of each of the provided reactants. The 0.0712 moles of silicon would yield

$$\text{mol Si}_3\text{N}_4\ \text{produced} = 0.0712\ \text{mol Si} \times \frac{1\ \text{mol Si}_3\text{N}_4}{3\ \text{mol Si}} = 0.0237\ \text{mol Si}_3\text{N}_4$$

while the 0.0535 moles of nitrogen would produce

$$\text{mol Si}_3\text{N}_4\ \text{produced} = 0.0535\ \text{mol N}_2 \times \frac{1\ \text{mol Si}_3\text{N}_4}{2\ \text{mol N}_2} = 0.0268\ \text{mol Si}_3\text{N}_4$$

Since silicon yields the lesser amount of product, it is the limiting reactant.

? Exercise 4.5.1

Which is the limiting reactant when 5.00 g of H_2 and 10.0 g of O_2 react and form water?

Answer

O_2

Percent Yield

The amount of product that *may be* produced by a reaction under specified conditions, as calculated per the stoichiometry of an appropriate balanced chemical equation, is called the theoretical yield of the reaction. In practice, the amount of product obtained is called the actual yield, and it is often less than the theoretical yield for a number of reasons. Some reactions are inherently inefficient, being accompanied by *side reactions* that generate other products. Others are, by nature, incomplete (consider the partial reactions of weak acids and bases discussed earlier in this text). Some products are difficult to collect without some loss, and so less than perfect recovery will reduce the actual yield. The extent to which a reaction's theoretical yield is achieved is commonly expressed as its percent yield:

$$\text{percent yield} = \frac{\text{actual yield}}{\text{theoretical yield}} \times 100\%$$

Actual and theoretical yields may be expressed as masses or molar amounts (or any other appropriate property; e.g., volume, if the product is a gas). As long as both yields are expressed using the same units, these units will cancel when percent yield is calculated.

Example 4.5.2: Calculation of Percent Yield

Upon reaction of 1.274 g of copper sulfate with excess zinc metal, 0.392 g copper metal was obtained according to the equation:

$$\mathrm{CuSO_4}(aq) + \mathrm{Zn}(s) \rightarrow \mathrm{Cu}(s) + \mathrm{ZnSO_4}(aq)$$

What is the percent yield?

Solution

The provided information identifies copper sulfate as the limiting reactant, and so the theoretical yield is found by the approach illustrated in the previous module, as shown here:

Double subscripts: use braces to clarify

Using this theoretical yield and the provided value for actual yield, the percent yield is calculated to be

$$\text{percent yield} = \left(\frac{\text{actual yield}}{\text{theoretical yield}}\right) \times 100$$

$$\begin{aligned}\text{percent yield} &= \left(\frac{0.392\ \text{g Cu}}{0.5072\ \text{g Cu}}\right) \times 100 \\ &= 77.3\%\end{aligned}$$

Exercise 4.5.2

What is the percent yield of a reaction that produces 12.5 g of the gas Freon CF_2Cl_2 from 32.9 g of CCl_4 and excess HF?

$$\mathrm{CCl_4} + 2\,\mathrm{HF} \rightarrow \mathrm{CF_2Cl_2} + 2\,\mathrm{HCl}$$

Answer

48.3%

Green Chemistry and Atom Economy

The purposeful design of chemical products and processes that minimize the use of environmentally hazardous substances and the generation of waste is known as *green chemistry*. Green chemistry is a philosophical approach that is being applied to many areas of science and technology, and its practice is summarized by guidelines known as the "Twelve Principles of Green Chemistry". One of the 12 principles is aimed specifically at maximizing the efficiency of processes for synthesizing chemical products. The *atom economy* of a process is a measure of this efficiency, defined as the percentage by mass of the final product of a synthesis relative to the masses of *all* the reactants used:

$$\text{atom economy} = \frac{\text{mass of product}}{\text{mass of reactants}} \times 100\%$$

Though the definition of atom economy at first glance appears very similar to that for percent yield, be aware that this property represents a difference in the *theoretical* efficiencies of *different* chemical processes. The percent yield of a given chemical process, on the other hand, evaluates the efficiency of a process by comparing the yield of product actually obtained to the maximum yield predicted by stoichiometry.

The synthesis of the common nonprescription pain medication, ibuprofen, nicely illustrates the success of a green chemistry approach (Figure 4.5.3). First marketed in the early 1960s, ibuprofen was produced using a six-step synthesis that required 514 g of reactants to generate each mole (206 g) of ibuprofen, an atom economy of 40%. In the 1990s, an alternative process was developed by the BHC Company (now BASF Corporation) that requires only three steps and has an atom economy of ~80%, nearly twice that of the original process. The BHC process generates significantly less chemical waste; uses less-hazardous and recyclable materials; and provides significant cost-savings to the manufacturer (and, subsequently, the consumer). In

recognition of the positive environmental impact of the BHC process, the company received the Environmental Protection Agency's Greener Synthetic Pathways Award in 1997.

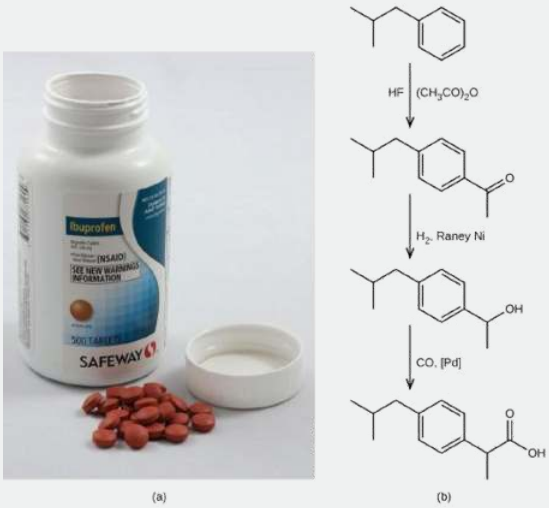

Figure **4.5.3**: (a) Ibuprofen is a popular nonprescription pain medication commonly sold as 200 mg tablets. (b) The BHC process for synthesizing ibuprofen requires only three steps and exhibits an impressive atom economy. (credit a: modification of work by Derrick Coetzee)

Summary

When reactions are carried out using less-than-stoichiometric quantities of reactants, the amount of product generated will be determined by the limiting reactant. The amount of product generated by a chemical reaction is its actual yield. This yield is often less than the amount of product predicted by the stoichiometry of the balanced chemical equation representing the reaction (its theoretical yield). The extent to which a reaction generates the theoretical amount of product is expressed as its percent yield.

Key Equations

- $\text{percent yield} = \left(\frac{\text{actual yield}}{\text{theoretical yield}}\right) \times 100$

Glossary

actual yield
amount of product formed in a reaction

excess reactant
reactant present in an amount greater than required by the reaction stoichiometry

limiting reactant
reactant present in an amount lower than required by the reaction stoichiometry, thus limiting the amount of product generated

percent yield
measure of the efficiency of a reaction, expressed as a percentage of the theoretical yield

theoretical yield
amount of product that may be produced from a given amount of reactant(s) according to the reaction stoichiometry

This page titled 4.5: Reaction Yields is shared under a CC BY license and was authored, remixed, and/or curated by OpenStax.

- **4.5: Reaction Yields** by OpenStax is licensed CC BY 4.0. Original source: https://openstax.org/details/books/chemistry-2e.

4.6: Quantitative Chemical Analysis

Learning Objectives

- Describe the fundamental aspects of titrations and gravimetric analysis.
- Perform stoichiometric calculations using typical titration and gravimetric data.

In the 18th century, the strength (actually the concentration) of vinegar samples was determined by noting the amount of potassium carbonate, K_2CO_3, which had to be added, a little at a time, before bubbling ceased. The greater the weight of potassium carbonate added to reach the point where the bubbling ended, the more concentrated the vinegar.

We now know that the effervescence that occurred during this process was due to reaction with acetic acid, CH_3CO_2H, the compound primarily responsible for the odor and taste of vinegar. Acetic acid reacts with potassium carbonate according to the following equation:

$$2\,CH_3CO_2H(aq) + K_2CO_3(s) \rightarrow 2KCH_3CO_3(aq) + CO_2(g) + H_2O(l)$$

The bubbling was due to the production of CO_2.

The test of vinegar with potassium carbonate is one type of quantitative analysis—the determination of the amount or concentration of a substance in a sample. In the analysis of vinegar, the concentration of the solute (acetic acid) was determined from the amount of reactant that combined with the solute present in a known volume of the solution. In other types of chemical analyses, the amount of a substance present in a sample is determined by measuring the amount of product that results.

Titration

The described approach to measuring vinegar strength was an early version of the analytical technique known as titration analysis. A typical titration analysis involves the use of a buret (Figure **4.6.1**) to make incremental additions of a solution containing a known concentration of some substance (the titrant) to a sample solution containing the substance whose concentration is to be measured (the analyte). The titrant and analyte undergo a chemical reaction of known stoichiometry, and so measuring the volume of titrant solution required for complete reaction with the analyte (the equivalence point of the titration) allows calculation of the analyte concentration. The equivalence point of a titration may be detected visually if a distinct change in the appearance of the sample solution accompanies the completion of the reaction. The halt of bubble formation in the classic vinegar analysis is one such example, though, more commonly, special dyes called indicators are added to the sample solutions to impart a change in color at or very near the equivalence point of the titration. Equivalence points may also be detected by measuring some solution property that changes in a predictable way during the course of the titration. Regardless of the approach taken to detect a titration's equivalence point, the volume of titrant actually measured is called the end point. Properly designed titration methods typically ensure that the difference between the equivalence and end points is negligible. Though any type of chemical reaction may serve as the basis for a titration analysis, the three described in this chapter (precipitation, acid-base, and redox) are most common. Additional details regarding titration analysis are provided in the chapter on acid-base equilibria.



(a) (b)

Figure 4.6.1: (a) A student fills a buret in preparation for a titration analysis. (b) A typical buret permits volume measurements to the nearest 0.1 mL. (credit a: modification of work by Mark Blaser and Matt Evans; credit b: modification of work by Mark Blaser and Matt Evans)

Two pictures are shown. In a, a person is shown pouring a liquid from a small beaker into a buret. The person is wearing goggles and gloves as she transfers the solution into the buret. In b, a close up view of the markings on the side of the buret is shown. The markings for 10, 15, and 20 are clearly shown with horizontal rings printed on the buret. Between each of these whole number markings, half markings are also clearly shown with horizontal line segment markings.

Example 4.6.1: Titration Analysis

The end point in a titration of a 50.00-mL sample of aqueous HCl was reached by addition of 35.23 mL of 0.250 M NaOH titrant. The titration reaction is:

$$\mathrm{HCl}(aq) + \mathrm{NaOH}(aq) \rightarrow \mathrm{NaCl}(aq) + \mathrm{H_2O}(l)$$

What is the molarity of the HCl?

Solution

As for all reaction stoichiometry calculations, the key issue is the relation between the molar amounts of the chemical species of interest as depicted in the balanced chemical equation. The approach outlined in previous modules of this chapter is followed, with additional considerations required, since the amounts of reactants provided and requested are expressed as solution concentrations.

For this exercise, the calculation will follow the following outlined steps:

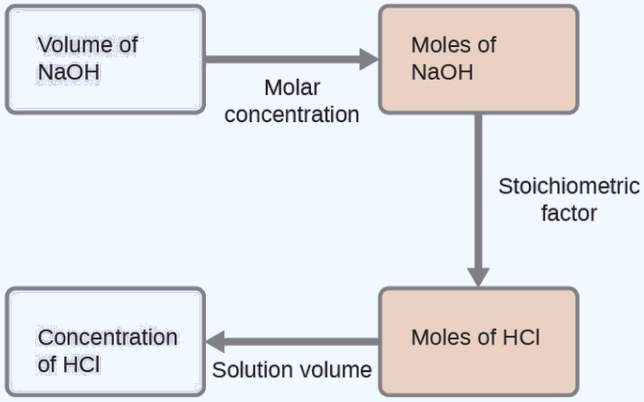

This figure shows four rectangles. The first is shaded lavender and is labeled, “Volume of N a O H.” This rectangle is followed by an arrow pointing right which is labeled, “Molar concentration,” to a second rectangle. This second rectangle is shaded pink and is labeled, “Moles of N a O H.” This rectangle is followed by an arrow pointing right which is labeled, “Stoichiometric factor,” to a third rectangle which is shaded pink and is labeled, “Moles of H C l.” This rectangle is followed by an arrow labeled, “Solution volume,” which points right to a fourth rectangle. This fourth rectangle is shaded lavender and is labeled, “Concentration of H C l.”

The molar amount of HCl is calculated to be:

$$35.23\ \cancel{\text{mL NaOH}} \times \frac{1\ \cancel{L}}{1000\ \cancel{\text{mL}}} \times \frac{0.250\ \cancel{\text{mol NaOH}}}{1\ \cancel{L}} \times \frac{1\ \text{mol HCl}}{1\ \cancel{\text{mol NaOH}}} = 8.81 \times 10^{-3}\ \text{mol HCl}$$

Using the provided volume of HCl solution and the definition of molarity, the HCl concentration is:

$$M = \frac{\text{mol HCl}}{\text{L solution}}$$

$$M = \frac{8.81 \times 10^{-3}\ \text{mol HCl}}{50.00\ \text{mL} \times \frac{1\ \text{L}}{1000\ \text{mL}}}$$

$$M = 0.176\ M$$

Note: For these types of titration calculations, it is convenient to recognize that solution molarity is also equal to the number of *milli*moles of solute per *milli*liter of solution:

$$M = \frac{\text{mol solute}}{\text{L solution}} \times \frac{\frac{10^3\ \text{mmol}}{\text{mol}}}{\frac{10^3\ \text{mL}}{\text{L}}} = \frac{\text{mmol solute}}{\text{mL solution}}$$

Using this version of the molarity unit will shorten the calculation by eliminating two conversion factors:

$$\frac{35.23\ \text{mL NaOH} \times \frac{0.250\ \text{mmol NaOH}}{\text{mL NaOH}} \times \frac{1\ \text{mmol HCl}}{1\ \text{mmol NaOH}}}{50.00\ \text{mL solution}} = 0.176\ M\ \text{HCl}$$

? Exercise 4.6.1

A 20.00-mL sample of aqueous oxalic acid, $H_2C_2O_4$, was titrated with a 0.09113-*M* solution of potassium permanganate, $KMnO_4$.

$$2\,MnO_4^-(aq) + 5\,H_2C_2O_4(aq) + 6\,H^+(aq) \rightarrow 10\,CO_2(g) + 2\,Mn^{2+}(aq) + 8\,H_2O(l)$$

A volume of 23.24 mL was required to reach the end point. What is the oxalic acid molarity?

Answer

0.2648 *M*

Gravimetric Analysis

A gravimetric analysis is one in which a sample is subjected to some treatment that causes a change in the physical state of the analyte that permits its separation from the other components of the sample. Mass measurements of the sample, the isolated analyte, or some other component of the analysis system, used along with the known stoichiometry of the compounds involved, permit calculation of the analyte concentration. Gravimetric methods were the first techniques used for quantitative chemical analysis, and they remain important tools in the modern chemistry laboratory.

The required change of state in a gravimetric analysis may be achieved by various physical and chemical processes. For example, the moisture (water) content of a sample is routinely determined by measuring the mass of a sample before and after it is subjected to a controlled heating process that evaporates the water. Also common are gravimetric techniques in which the analyte is subjected to a precipitation reaction of the sort described earlier in this chapter. The precipitate is typically isolated from the reaction mixture by filtration, carefully dried, and then weighed (Figure **4.6.2**). The mass of the precipitate may then be used, along with relevant stoichiometric relationships, to calculate analyte concentration.

Figure **4.6.2**: Precipitate may be removed from a reaction mixture by filtration.

"A photo is shown of a flask and funnel used for filtration. The flask contains a slightly opaque liquid filtrate with a slight yellow tint. A funnel, which contains a bright yellow and orange material, sits atop the flask. The flask is held in place by a clamp and is connected to a vacuum line. The connection between the funnel and flask is sealed with a rubber bung or gasket."

Example **4.6.2**: Gravimetric Analysis

A 0.4550-g solid mixture containing $MgSO_4$ is dissolved in water and treated with an excess of $Ba(NO_3)_2$, resulting in the precipitation of 0.6168 g of $BaSO_4$.

$$MgSO_4(aq) + Ba(NO_3)_2(aq) \rightarrow BaSO_4(s) + Mg(NO_3)_2(aq)$$

What is the concentration (percent) of $MgSO_4$ in the mixture?

Solution

The plan for this calculation is similar to others used in stoichiometric calculations, the central step being the connection between the moles of $BaSO_4$ and $MgSO_4$ through their stoichiometric factor. Once the mass of $MgSO_4$ is computed, it may be used along with the mass of the sample mixture to calculate the requested percentage concentration.

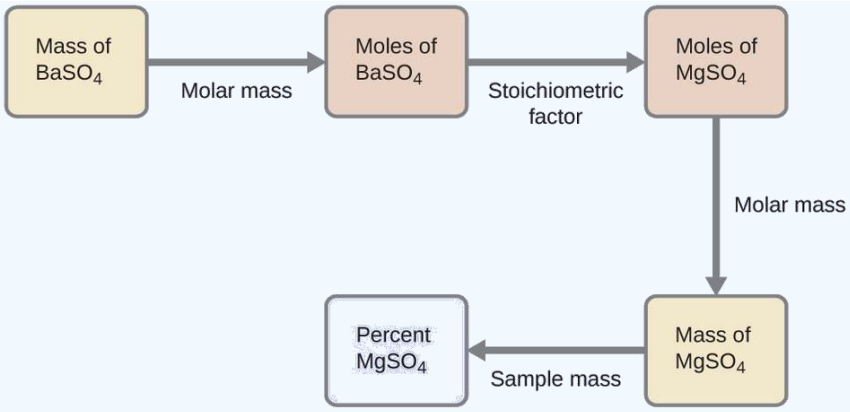

"This figure shows five rectangles. The first is shaded yellow and is labeled “Mass of B a S O subscript 4.” This rectangle is followed by an arrow pointing right to a second rectangle. The arrow is labeled, “Molar mass.” The second rectangle is shaded pink and is labeled, “Moles of B a S O subscript 4.” This rectangle is followed by an arrow pointing right to a third rectangle. The arrow is labeled, “Stoichiometric factor.” This third rectangle is shaded pink and is labeled, “Moles of M g S O subscript 4.” This rectangle is followed by an arrow labeled, “Molar mass,” which points downward to a fourth rectangle. This fourth rectangle is shaded yellow and is labeled, “Mass of M g S O subscript 4.” This rectangle is followed by an arrow labeled, “Sample mass,” which points left to a fifth rectangle. This fifth rectangle is shaded lavender and is labeled, “Percent M g S O subscript 4."

The mass of $MgSO_4$ that would yield the provided precipitate mass is

$$0.6168 \cancel{\text{ g BaSO}_4} \times \frac{1 \cancel{\text{ mol BaSO}_4}}{233.43 \cancel{\text{ g BaSO}_4}} \times \frac{1 \cancel{\text{ mol MgSO}_4}}{1 \cancel{\text{ mol BaSO}_4}} \times \frac{120.37 \text{ g MgSO}_4}{1 \cancel{\text{ mol MgSO}_4}} = 0.3181 \text{ g MgSO}_4$$

The concentration of $MgSO_4$ in the sample mixture is then calculated to be

$$\text{percent } \text{MgSO}_4 = \frac{mass\ MgSO4}{mass\ sample} \times 100\%$$

$$\frac{0.3181 \text{ g}}{0.4550 \text{ g}} \times 100\% = 69.91\%$$

? Exercise 4.6.2

What is the percent of chloride ion in a sample if 1.1324 g of the sample produces 1.0881 g of AgCl when treated with excess Ag^+?

$$\text{Ag}^+(aq) + \text{Cl}^-(aq) \rightarrow \text{AgCl}(s)$$

Answer

23.76%

Combustion Analysis

The elemental composition of hydrocarbons and related compounds may be determined via a gravimetric method known as combustion analysis. In a combustion analysis, a weighed sample of the compound is heated to a high temperature under a stream of oxygen gas, resulting in its complete combustion to yield gaseous products of known identities. The complete combustion of hydrocarbons, for example, will yield carbon dioxide and water as the only products. The gaseous combustion products are swept through separate, preweighed collection devices containing compounds that selectively absorb each product (Figure **4.6.3**). The mass increase of each device corresponds to the mass of the absorbed product and may be used in an appropriate stoichiometric calculation to derive the mass of the relevant element.

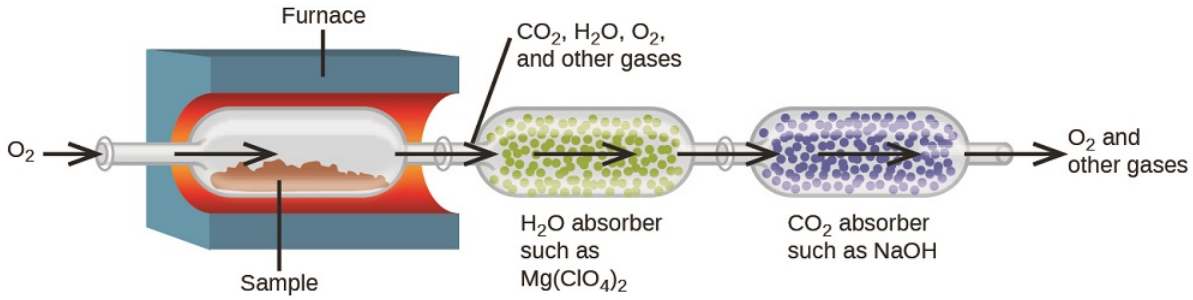

Figure **4.6.3**: This schematic diagram illustrates the basic components of a combustion analysis device for determining the carbon and hydrogen content of a sample.

This diagram shows an arrow pointing from O subscript 2 into a tube that leads into a vessel containing a red material, labeled “Sample.” This vessel is inside a blue container with a red inner lining which is labeled “Furnace.” An arrow points from the tube to the right into the vessel above the red sample material. An arrow leads out of this vessel through a tube into a second vessel outside the furnace. An line points from this tube to a label above the diagram that reads “C O subscript 2, H subscript 2 O, O subscript 2, and other gases.” Many small green spheres are visible in the second vessel which is labeled below, “H subscript 2 O absorber such as M g (C l O subscript 4) subscript 2.” An arrow points to the right through the vessel, and another arrow points right heading out of the vessel through a tube into a third vessel. The third vessel contains many small blue spheres. It is labeled “C O subscript 2 absorber such as N a O H.” An arrow points right through this vessel, and a final arrow points out of a tube at the right end of the vessel. Outside the end of this tube at the end of the arrow is the label, “O subscript 2 and other gases.”

Example **4.6.3**: Combustion Analysis

Polyethylene is a hydrocarbon polymer used to produce food-storage bags and many other flexible plastic items. A combustion analysis of a 0.00126-g sample of polyethylene yields 0.00394 g of CO_2 and 0.00161 g of H_2O. What is the empirical formula of polyethylene?

Solution

The primary assumption in this exercise is that all the carbon in the sample combusted is converted to carbon dioxide, and all the hydrogen in the sample is converted to water:

Double subscripts: use braces to clarify

Note that a balanced equation is not necessary for the task at hand. To derive the empirical formula of the compound, only the subscripts *x* and *y* are needed.

First, calculate the molar amounts of carbon and hydrogen in the sample, using the provided masses of the carbon dioxide and water, respectively. With these molar amounts, the empirical formula for the compound may be written as described in the previous chapter of this text. An outline of this approach is given in the following flow chart:

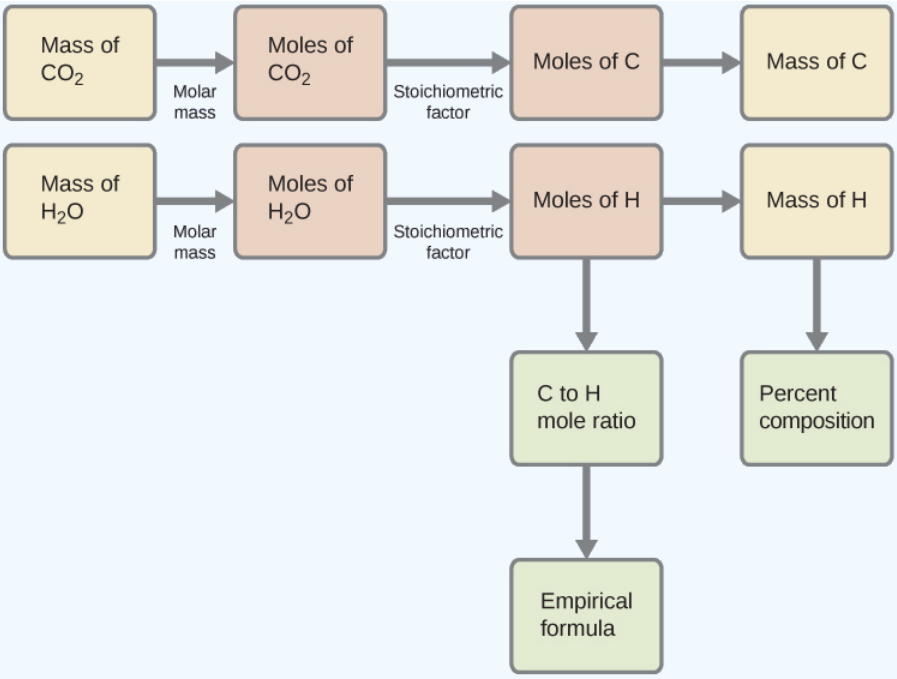

This figure shows two flowcharts. The first row is a single flow chart. In this row, a rectangle at the left is shaded yellow and is labeled, “Mass of C O subscript 2.” This rectangle is followed by an arrow pointing right to a second rectangle. The arrow is labeled, “Molar mass.” The second rectangle is shaded pink and is labeled, “Moles of C O subscript 2.” This rectangle is followed by an arrow pointing right to a third rectangle. The arrow is labeled, “Stoichiometric factor.” The third rectangle is shaded pink and is labeled, “Moles of C.” This rectangle is followed by an arrow labeled “Molar mass” which points right to a fourth rectangle. The fourth rectangle is shaded yellow and is labeled “Mass of C.” Below, is a second flowchart. It begins with a yellow shaded rectangle on the left which is labeled, “Mass of H subscript 2 O.” This rectangle is followed by an arrow labeled, “Molar mass,” which points right to a second rectangle. The second rectangle is shaded pink and is labeled, “Moles of H subscript 2 O.” This rectangle is followed by an arrow pointing right to a third rectangle. The arrow is labeled, “Stoichiometric factor.” The third rectangle is shaded pink and is labeled “Moles of H.” This rectangle is followed to the right by an arrow labeled, “Molar mass,” which points to a fourth rectangle. The fourth rectangle is shaded yellow and is labeled “Mass of H.” An arrow labeled, “Sample mass” points down beneath this rectangle to a green shaded rectangle. This rectangle is labeled, “Percent composition.” An arrow extends beneath the pink rectangle labeled, “Moles of H,” to a green shaded rectangle labeled, “C to H mole ratio.” Beneath this rectangle, an arrow extends to a second green shaded rectangle which is labeled, “Empirical formula.”

$$\text{mol C} = 0.00394\ \text{g CO}_2 \times \frac{1\ \text{mol CO}_2}{44.01\ \text{g/mol}} \times \frac{1\ \text{mol C}}{1\ \text{mol CO}_2} = 8.95 \times 10^{-5}\ \text{mol C}$$

$$\text{mol H} = 0.00161\ \text{g H}_2\text{O} \times \frac{1\ \text{mol H}_2\text{O}}{18.02\ \text{g/mol}} \times \frac{2\ \text{mol H}}{1\ \text{mol H}_2\text{O}} = 1.79 \times 10^{-4}\ \text{mol H}$$

The empirical formula for the compound is then derived by identifying the smallest whole-number multiples for these molar amounts. The H-to-C molar ratio is

$$\frac{\text{mol H}}{\text{mol C}} = \frac{1.79 \times 10^{-4}\ \text{mol H}}{8.95 \times 10^{-5}\ \text{mol C}} = \frac{2\ \text{mol H}}{1\ \text{mol C}}$$

and the empirical formula for polyethylene is CH_2.

? Exercise 4.6.3

A 0.00215-g sample of polystyrene, a polymer composed of carbon and hydrogen, produced 0.00726 g of CO_2 and 0.00148 g of H_2O in a combustion analysis. What is the empirical formula for polystyrene?

Answer

Summary

The stoichiometry of chemical reactions may serve as the basis for quantitative chemical analysis methods. Titrations involve measuring the volume of a titrant solution required to completely react with a sample solution. This volume is then used to calculate the concentration of analyte in the sample using the stoichiometry of the titration reaction. Gravimetric analysis involves separating the analyte from the sample by a physical or chemical process, determining its mass, and then calculating its concentration in the sample based on the stoichiometry of the relevant process. Combustion analysis is a gravimetric method used to determine the elemental composition of a compound by collecting and weighing the gaseous products of its combustion.

Glossary

analyte
chemical species of interest

buret
device used for the precise delivery of variable liquid volumes, such as in a titration analysis

combustion analysis
gravimetric technique used to determine the elemental composition of a compound via the collection and weighing of its gaseous combustion products

end point
measured volume of titrant solution that yields the change in sample solution appearance or other property expected for stoichiometric equivalence (see *equivalence point*)

equivalence point
volume of titrant solution required to react completely with the analyte in a titration analysis; provides a stoichiometric amount of titrant for the sample's analyte according to the titration reaction

gravimetric analysis
quantitative chemical analysis method involving the separation of an analyte from a sample by a physical or chemical process and subsequent mass measurements of the analyte, reaction product, and/or sample

indicator
substance added to the sample in a titration analysis to permit visual detection of the end point

quantitative analysis
the determination of the amount or concentration of a substance in a sample

titrant
solution containing a known concentration of substance that will react with the analyte in a titration analysis

titration analysis
quantitative chemical analysis method that involves measuring the volume of a reactant solution required to completely react with the analyte in a sample

This page titled 4.6: Quantitative Chemical Analysis is shared under a CC BY license and was authored, remixed, and/or curated by OpenStax.

- **4.6: Quantitative Chemical Analysis** by OpenStax is licensed CC BY 4.0. Original source: https://openstax.org/details/books/chemistry-2e.

CHAPTER OVERVIEW

5: Thermochemistry

A general chemistry Libretexts Textmap organized around the textbook
General Chemistry -Atoms First
By OpenStax

I II III IV V VI VII VIII IX X XI XII XIII XIV XV XVI XVII XVIII XIX XX XXI ● **Homework**

Useful forms of energy are also available from a variety of chemical reactions other than combustion. For example, the energy produced by the batteries in a cell phone, car, or flashlight results from chemical reactions. This chapter introduces many of the basic ideas necessary to explore the relationships between chemical changes and energy, with a focus on thermal energy.

Topic hierarchy

5.1: Prelude to Thermochemistry
5.2: Energy Basics
5.3: Calorimetry
5.4: Enthalpy

Contributors

- Paul Flowers (University of North Carolina - Pembroke), Klaus Theopold (University of Delaware) and Richard Langley (Stephen F. Austin State University) with contributing authors. Textbook content produced by OpenStax College is licensed under a Creative Commons Attribution License 4.0 license. Download for free at http://cnx.org/contents/85abf193-2bd...a7ac8df6@9.110).

This page titled 5: Thermochemistry is shared under a CC BY license and was authored, remixed, and/or curated by OpenStax.

5.1: Prelude to Thermochemistry

Chemical reactions, such as those that occur when you light a match, involve changes in energy as well as matter. Societies at all levels of development could not function without the energy released by chemical reactions. In 2012, about 85% of US energy consumption came from the combustion of petroleum products, coal, wood, and garbage. We use this energy to produce electricity (38%); to transport food, raw materials, manufactured goods, and people (27%); for industrial production (21%); and to heat and power our homes and businesses (10%).[1] While these combustion reactions help us meet our essential energy needs, they are also recognized by the majority of the scientific community as a major contributor to global climate change.

Figure **5.1.1**: Sliding a match head along a rough surface initiates a combustion reaction that produces energy in the form of heat and light. (credit: modification of work by Laszlo Ilyes).

Useful forms of energy are also available from a variety of chemical reactions other than combustion. For example, the energy produced by the batteries in a cell phone, car, or flashlight results from chemical reactions. This chapter introduces many of the basic ideas necessary to explore the relationships between chemical changes and energy, with a focus on thermal energy.

Footnotes

1. US Energy Information Administration, *Primary Energy Consumption by Source and Sector, 2012*, Total Energy [www.eia.gov]. Data derived from US Energy Information Administration, *Monthly Energy Review* (January 2014).

This page titled 5.1: Prelude to Thermochemistry is shared under a CC BY license and was authored, remixed, and/or curated by OpenStax.

- **5.1: Prelude to Thermochemistry** by OpenStax is licensed CC BY 4.0. Original source: https://openstax.org/details/books/chemistry-2e.

5.2: Energy Basics

Learning Objectives

- Define energy, distinguish types of energy, and describe the nature of energy changes that accompany chemical and physical changes
- Distinguish the related properties of heat, thermal energy, and temperature
- Define and distinguish specific heat and heat capacity, and describe the physical implications of both
- Perform calculations involving heat, specific heat, and temperature change

Chemical changes and their accompanying changes in energy are important parts of our everyday world (Figure **5.2.1**). The macronutrients in food (proteins, fats, and carbohydrates) undergo metabolic reactions that provide the energy to keep our bodies functioning. We burn a variety of fuels (gasoline, natural gas, coal) to produce energy for transportation, heating, and the generation of electricity. Industrial chemical reactions use enormous amounts of energy to produce raw materials (such as iron and aluminum). Energy is then used to manufacture those raw materials into useful products, such as cars, skyscrapers, and bridges.

(a) (b) (c)

Figure **5.2.1**: The energy involved in chemical changes is important to our daily lives: (a) A cheeseburger for lunch provides the energy you need to get through the rest of the day; (b) the combustion of gasoline provides the energy that moves your car (and you) between home, work, and school; and (c) coke, a processed form of coal, provides the energy needed to convert iron ore into iron, which is essential for making many of the products we use daily. (credit a: modification of work by "Pink Sherbet Photography"/Flickr; credit b: modification of work by Jeffery Turner).

Over 90% of the energy we use comes originally from the sun. Every day, the sun provides the earth with almost 10,000 times the amount of energy necessary to meet all of the world's energy needs for that day. Our challenge is to find ways to convert and store incoming solar energy so that it can be used in reactions or chemical processes that are both convenient and nonpolluting. Plants and many bacteria capture solar energy through photosynthesis. We release the energy stored in plants when we burn wood or plant products such as ethanol. We also use this energy to fuel our bodies by eating food that comes directly from plants or from animals that got their energy by eating plants. Burning coal and petroleum also releases stored solar energy: These fuels are fossilized plant and animal matter.

This chapter will introduce the basic ideas of an important area of science concerned with the amount of heat absorbed or released during chemical and physical changes—an area called thermochemistry. The concepts introduced in this chapter are widely used in almost all scientific and technical fields. Food scientists use them to determine the energy content of foods. Biologists study the energetics of living organisms, such as the metabolic combustion of sugar into carbon dioxide and water. The oil, gas, and transportation industries, renewable energy providers, and many others endeavor to find better methods to produce energy for our commercial and personal needs. Engineers strive to improve energy efficiency, find better ways to heat and cool our homes, refrigerate our food and drinks, and meet the energy and cooling needs of computers and electronics, among other applications. Understanding thermochemical principles is essential for chemists, physicists, biologists, geologists, every type of engineer, and just about anyone who studies or does any kind of science.

Energy

Energy can be defined as the capacity to supply heat or do work. One type of work (w) is the process of causing matter to move against an opposing force. For example, we do work when we inflate a bicycle tire—we move matter (the air in the pump) against

the opposing force of the air surrounding the tire.

Like matter, energy comes in different types. One scheme classifies energy into two types: potential energy, the energy an object has because of its relative position, composition, or condition, and kinetic energy, the energy that an object possesses because of its motion. Water at the top of a waterfall or dam has potential energy because of its position; when it flows downward through generators, it has kinetic energy that can be used to do work and produce electricity in a hydroelectric plant (Figure **5.2.2**). A battery has potential energy because the chemicals within it can produce electricity that can do work.

(a) (b)

Figure **5.2.2**: (a) Water that is higher in elevation, for example, at the top of Victoria Falls, has a higher potential energy than water at a lower elevation. As the water falls, some of its potential energy is converted into kinetic energy. (b) If the water flows through generators at the bottom of a dam, such as the Hoover Dam shown here, its kinetic energy is converted into electrical energy. (credit a: modification of work by Steve Jurvetson; credit b: modification of work by "curimedia"/Wikimedia commons).

Two pictures are shown and labeled a and b. Picture a shows a large waterfall with water falling from a high elevation at the top of the falls to a lower elevation. The second picture is a view looking down into the Hoover Dam. Water is shown behind the high wall of the dam on one side and at the base of the dam on the other.

Energy can be converted from one form into another, but all of the energy present before a change occurs always exists in some form after the change is completed. This observation is expressed in the law of conservation of energy: during a chemical or physical change, energy can be neither created nor destroyed, although it can be changed in form. (This is also one version of the first law of thermodynamics, as you will learn later.)

When one substance is converted into another, there is always an associated conversion of one form of energy into another. Heat is usually released or absorbed, but sometimes the conversion involves light, electrical energy, or some other form of energy. For example, chemical energy (a type of potential energy) is stored in the molecules that compose gasoline. When gasoline is combusted within the cylinders of a car's engine, the rapidly expanding gaseous products of this chemical reaction generate mechanical energy (a type of kinetic energy) when they move the cylinders' pistons.

According to the law of conservation of matter (seen in an earlier chapter), there is no detectable change in the total amount of matter during a chemical change. When chemical reactions occur, the energy changes are relatively modest and the mass changes are too small to measure, so the laws of conservation of matter and energy hold well. However, in nuclear reactions, the energy changes are much larger (by factors of a million or so), the mass changes are measurable, and matter-energy conversions are significant. This will be examined in more detail in a later chapter on nuclear chemistry. To encompass both chemical and nuclear changes, we combine these laws into one statement: The total quantity of matter and energy in the universe is fixed.

Thermal Energy, Temperature, and Heat

Thermal energy is kinetic energy associated with the random motion of atoms and molecules. Temperature is a quantitative measure of "hot" or "cold." When the atoms and molecules in an object are moving or vibrating quickly, they have a higher average kinetic energy (KE), and we say that the object is "hot." When the atoms and molecules are moving slowly, they have lower KE, and we say that the object is "cold" (Figure **5.2.3**). Assuming that no chemical reaction or phase change (such as melting or vaporizing) occurs, increasing the amount of thermal energy in a sample of matter will cause its temperature to increase. And, assuming that no chemical reaction or phase change (such as condensation or freezing) occurs, decreasing the amount of thermal energy in a sample of matter will cause its temperature to decrease.

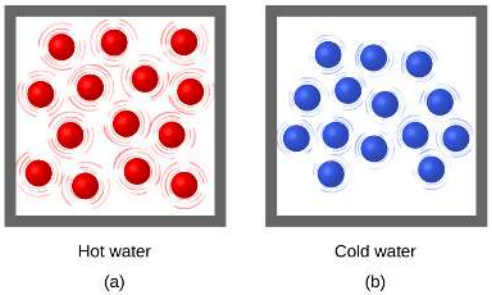

Figure **5.2.3**: (a) The molecules in a sample of hot water move more rapidly than (b) those in a sample of cold water.

Two molecular drawings are shown and labeled a and b. Drawing a is a box containing fourteen red spheres that are surrounded by lines indicating that the particles are moving rapidly. This drawing has a label that reads “Hot water.” Drawing b depicts another box of equal size that also contains fourteen spheres, but these are blue. They are all surrounded by smaller lines that depict some particle motion, but not as much as in drawing a. This drawing has a label that reads “Cold water.”

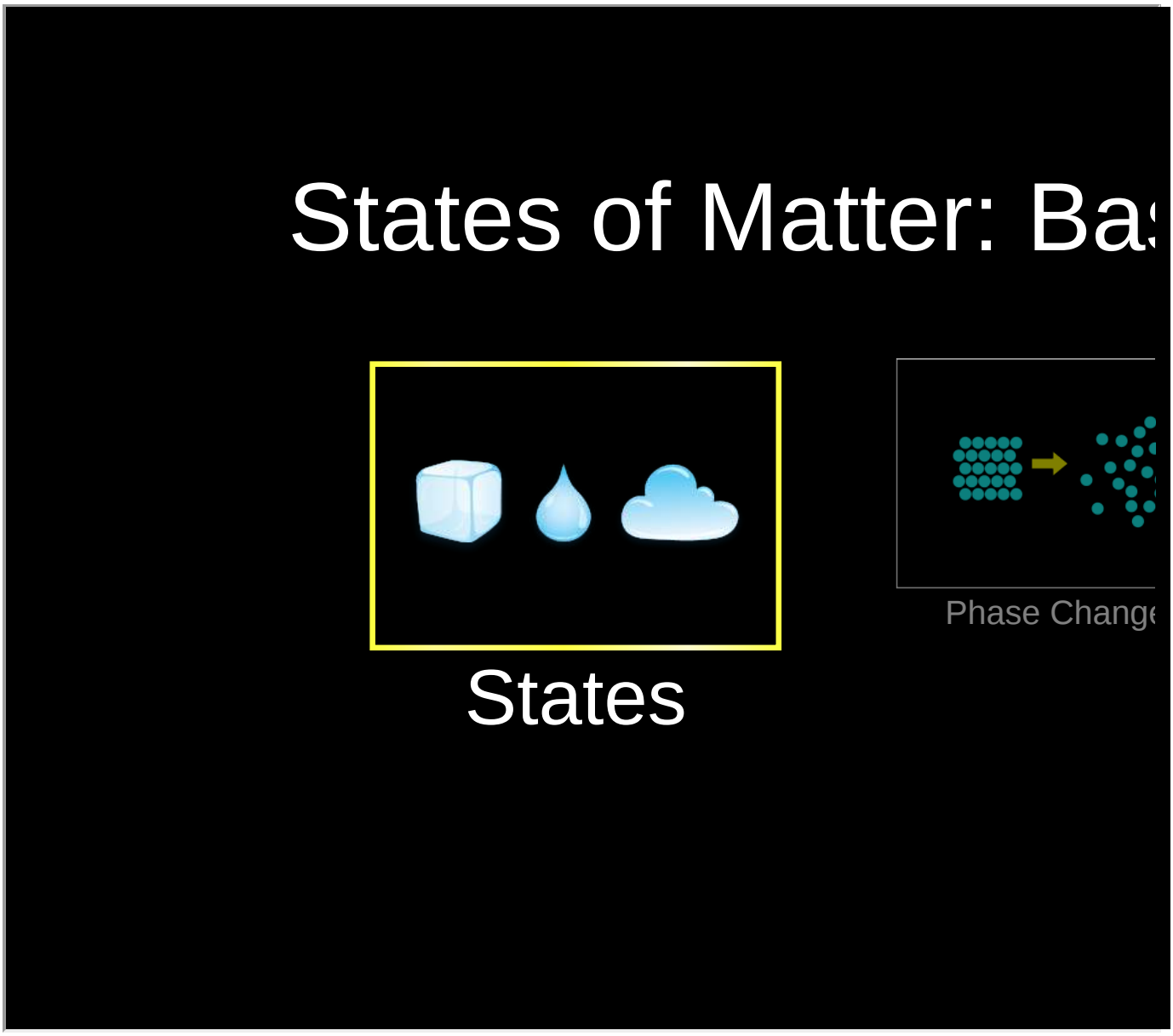

Measuring Energy and Heat Capacity

Historically, energy was measured in units of calories (cal). A calorie is the amount of energy required to raise one gram of water by 1 degree C (1 kelvin). However, this quantity depends on the atmospheric pressure and the starting temperature of the water. The ease of measurement of energy changes in calories has meant that the calorie is still frequently used. The Calorie (with a capital C), or large calorie, commonly used in quantifying food energy content, is a kilocalorie. The SI unit of heat, work, and energy is the joule. A joule (J) is defined as the amount of energy used when a force of 1 newton moves an object 1 meter. It is named in honor of the English physicist James Prescott Joule. One joule is equivalent to 1 kg m^2/s^2, which is also called 1 newton–meter. A kilojoule (kJ) is 1000 joules. To standardize its definition, 1 calorie has been set to equal 4.184 joules.

We now introduce two concepts useful in describing heat flow and temperature change. The heat capacity (C) of a body of matter is the quantity of heat (q) it absorbs or releases when it experiences a temperature change (ΔT) of 1 degree Celsius (or equivalently, 1 kelvin)

$$C = \frac{q}{\Delta T} \tag{5.2.1}$$

Heat capacity is determined by both the type and amount of substance that absorbs or releases heat. It is therefore an extensive property—its value is proportional to the amount of the substance.

For example, consider the heat capacities of two cast iron frying pans. The heat capacity of the large pan is five times greater than that of the small pan because, although both are made of the same material, the mass of the large pan is five times greater than the mass of the small pan. More mass means more atoms are present in the larger pan, so it takes more energy to make all of those atoms vibrate faster. The heat capacity of the small cast iron frying pan is found by observing that it takes 18,150 J of energy to raise the temperature of the pan by 50.0 °C

$$C_{\text{small pan}} = \frac{18,140\ \text{J}}{50.0\ ^\circ\text{C}} = 363\ \text{J/°C} \tag{5.2.2}$$

The larger cast iron frying pan, while made of the same substance, requires 90,700 J of energy to raise its temperature by 50.0 °C. The larger pan has a (proportionally) larger heat capacity because the larger amount of material requires a (proportionally) larger amount of energy to yield the same temperature change:

$$C_{\text{large pan}} = \frac{90,700\ \text{J}}{50.0\ ^\circ\text{C}} = 1814\ \text{J/°C} \tag{5.2.3}$$

The specific heat capacity (c) of a substance, commonly called its “specific heat,” is the quantity of heat required to raise the temperature of 1 gram of a substance by 1 degree Celsius (or 1 kelvin):

$$c = \frac{q}{\text{m}\Delta\text{T}} \tag{5.2.4}$$

Specific heat capacity depends only on the kind of substance absorbing or releasing heat. It is an intensive property—the type, but not the amount, of the substance is all that matters. For example, the small cast iron frying pan has a mass of 808 g. The specific heat of iron (the material used to make the pan) is therefore:

$$c_{\text{iron}} = \frac{18,140\ \text{J}}{(808\ \text{g})(50.0\ ^\circ\text{C})} = 0.449\ \text{J/g °C} \tag{5.2.5}$$

The large frying pan has a mass of 4040 g. Using the data for this pan, we can also calculate the specific heat of iron:

$$c_{\text{iron}} = \frac{90,700\ \text{J}}{(4,040\ \text{g})(50.0\ ^\circ\text{C})} = 0.449\ \text{J/g °C} \tag{5.2.6}$$

Although the large pan is more massive than the small pan, since both are made of the same material, they both yield the same value for specific heat (for the material of construction, iron). Note that specific heat is measured in units of energy per temperature per mass and is an intensive property, being derived from a ratio of two extensive properties (heat and mass). The molar heat capacity, also an intensive property, is the heat capacity per mole of a particular substance and has units of J/mol °C (Figure **5.2.7**).

Figure **5.2.7**: Due to its larger mass, a large frying pan has a larger heat capacity than a small frying pan. Because they are made of the same material, both frying pans have the same specific heat. (credit: Mark Blaser).

The picture shows two black metal frying pans sitting on a flat surface. The left pan is about half the size of the right pan.

Liquid water has a relatively high specific heat (about 4.2 J/g °C); most metals have much lower specific heats (usually less than 1 J/g °C). The specific heat of a substance varies somewhat with temperature. However, this variation is usually small enough that we will treat specific heat as constant over the range of temperatures that will be considered in this chapter. Specific heats of some common substances are listed in Table **5.2.1**.

Table **5.2.1**: Specific Heats of Common Substances at 25 °C and 1 bar

Substance	Symbol (state)	Specific Heat (J/g °C)
helium	$He(g)$	5.193
water	$H_2O(l)$	4.184
ethanol	$C_2H_6O(l)$	2.376
ice	$H_2O(s)$	2.093 (at −10 °C)
water vapor	$H_2O(g)$	1.864
nitrogen	$N_2(g)$	1.040
air		1.007
oxygen	$O_2(g)$	0.918
aluminum	$Al(s)$	0.897
carbon dioxide	$CO_2(g)$	0.853
argon	$Ar(g)$	0.522
iron	$Fe(s)$	0.449
copper	$Cu(s)$	0.385
lead	$Pb(s)$	0.130
gold	$Au(s)$	0.129
silicon	$Si(s)$	0.712

If we know the mass of a substance and its specific heat, we can determine the amount of heat, q, entering or leaving the substance by measuring the temperature change before and after the heat is gained or lost:

$$q = (\text{specific heat}) \times (\text{mass of substance}) \times (\text{temperature change})$$
$$q = c \times m \times \Delta T$$
$$= c \times m \times (T_{\text{final}} - T_{\text{initial}})$$

In this equation, c is the specific heat of the substance, m is its mass, and ΔT (which is read “delta T”) is the temperature change, $T_{\text{final}} - T_{\text{initial}}$. If a substance gains thermal energy, its temperature increases, its final temperature is higher than its initial temperature, $T_{\text{final}} - T_{\text{initial}}$ has a positive value, and the value of q is positive. If a substance loses thermal energy, its temperature decreases, the final temperature is lower than the initial temperature, $T_{\text{final}} - T_{\text{initial}}$ has a negative value, and the value of q is negative.

Example 5.2.1: Measuring Heat

A flask containing 8.0×10^2 g of water is heated, and the temperature of the water increases from 21 °C to 85 °C. How much heat did the water absorb?

Solution

To answer this question, consider these factors:

- the specific heat of the substance being heated (in this case, water)
- the amount of substance being heated (in this case, 800 g)
- the magnitude of the temperature change (in this case, from 21 °C to 85 °C).

The specific heat of water is 4.184 J/g °C, so to heat 1 g of water by 1 °C requires 4.184 J. We note that since 4.184 J is required to heat 1 g of water by 1 °C, we will need 800 times as much to heat 800 g of water by 1 °C. Finally, we observe that since 4.184 J are required to heat 1 g of water by 1 °C, we will need 64 times as much to heat it by 64 °C (that is, from 21 °C to 85 °C).

This can be summarized using the equation:

$$\begin{aligned} q &= c \times m \times \Delta T \\ &= c \times m \times (T_{\text{final}} - T_{\text{initial}}) \\ &= (4.184\ \text{J/}\cancel{\text{g}}^{\circ}\text{C}) \times (800\ \cancel{\text{g}}) \times (85 - 21)^{\circ}\text{C} \\ &= (4.184\ \text{J/}\cancel{\text{g}}^{\circ}\cancel{\text{C}}) \times (800\ \cancel{\text{g}}) \times (64)^{\circ}\cancel{\text{C}} \\ &= 210,000\ \text{J} (= 210\ \text{kJ}) \end{aligned}$$

Because the temperature increased, the water absorbed heat and q is positive.

Exercise 5.2.1

How much heat, in joules, must be added to a 5.00×10^2 g iron skillet to increase its temperature from 25 °C to 250 °C? The specific heat of iron is 0.451 J/g °C.

Answer

5.05×10^4 J

Note that the relationship between heat, specific heat, mass, and temperature change can be used to determine any of these quantities (not just heat) if the other three are known or can be deduced.

Example 5.2.2: Determining Other Quantities

A piece of unknown metal weighs 348 g. When the metal piece absorbs 6.64 kJ of heat, its temperature increases from 22.4 °C to 43.6 °C. Determine the specific heat of this metal (which might provide a clue to its identity).

Solution

Since mass, heat, and temperature change are known for this metal, we can determine its specific heat using the relationship:

$$q = c \times m \times \Delta T$$
$$= c \times m \times (T_{\text{final}} - T_{\text{initial}})$$

Substituting the known values:

$$6,640 \text{ J} = c \times (348 \text{ g}) \times (43.6 - 22.4) \text{ °C}$$

Solving:

$$c = \frac{6,640 \text{ J}}{(348 \text{ g}) \times (21.2 \text{°C})} = 0.900 \text{ J/g °C}$$

Comparing this value with the values in Table 5.2.1, this value matches the specific heat of aluminum, which suggests that the unknown metal may be aluminum.

? Exercise 5.2.2

A piece of unknown metal weighs 217 g. When the metal piece absorbs 1.43 kJ of heat, its temperature increases from 24.5 °C to 39.1 °C. Determine the specific heat of this metal, and predict its identity.

Answer

$c = 0.45 \text{ J/g °C}$; the metal is likely to be iron from checking Table 5.2.1.

Solar Thermal Energy Power Plants

The sunlight that reaches the earth contains thousands of times more energy than we presently capture. Solar thermal systems provide one possible solution to the problem of converting energy from the sun into energy we can use. Large-scale solar thermal plants have different design specifics, but all concentrate sunlight to heat some substance; the heat "stored" in that substance is then converted into electricity.

The Solana Generating Station in Arizona's Sonora Desert produces 280 megawatts of electrical power. It uses parabolic mirrors that focus sunlight on pipes filled with a heat transfer fluid (HTF) (Figure 5.2.8). The HTF then does two things: It turns water into steam, which spins turbines, which in turn produces electricity, and it melts and heats a mixture of salts, which functions as a thermal energy storage system. After the sun goes down, the molten salt mixture can then release enough of its stored heat to produce steam to run the turbines for 6 hours. Molten salts are used because they possess a number of beneficial properties, including high heat capacities and thermal conductivities.

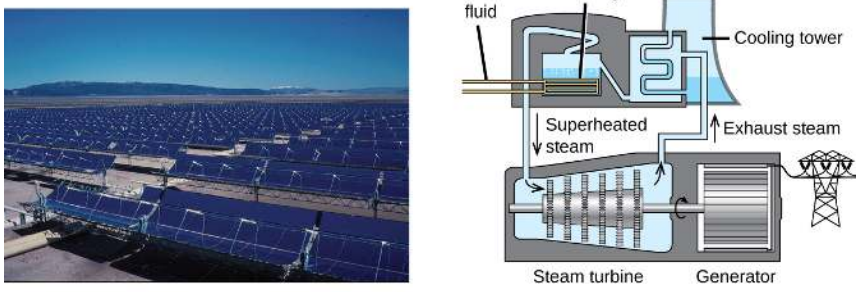

Figure 5.2.8: This solar thermal plant uses parabolic trough mirrors to concentrate sunlight. (credit a: modification of work by Bureau of Land Management)

This figure has two parts labeled a and b. Part a shows rows and rows of trough mirrors. Part b shows how a solar thermal plant works. Heat transfer fluid enters a tank via pipes. The tank contains water which is heated. As the heat is exchanged from the pipes to the water, the water becomes steam. The steam travels to a steam turbine. The steam turbine begins to turn which powers a generator. Exhaust steam exits the steam turbine and enters a cooling tower.

The 377-megawatt Ivanpah Solar Generating System, located in the Mojave Desert in California, is the largest solar thermal power plant in the world (Figure **5.2.9**). Its 170,000 mirrors focus huge amounts of sunlight on three water-filled towers, producing steam at over 538 °C that drives electricity-producing turbines. It produces enough energy to power 140,000 homes. Water is used as the working fluid because of its large heat capacity and heat of vaporization.

(a) (b)

Figure **5.2.9**: (a) The Ivanpah solar thermal plant uses 170,000 mirrors to concentrate sunlight on water-filled towers. (b) It covers 4000 acres of public land near the Mojave Desert and the California-Nevada border. (credit a: modification of work by Craig Dietrich; credit b: modification of work by "USFWS Pacific Southwest Region"/Flickr)

Two pictures are shown and labeled a and b. Picture a shows a thermal plant with three tall metal towers. Picture b is an arial picture of the mirrors used at the plant. They are arranged in rows.

Summary

Energy is the capacity to do work (applying a force to move matter). Kinetic energy (KE) is the energy of motion; potential energy is energy due to relative position, composition, or condition. When energy is converted from one form into another, energy is neither created nor destroyed (law of conservation of energy or first law of thermodynamics). Matter has thermal energy due to the KE of its molecules and temperature that corresponds to the average KE of its molecules. Heat is energy that is transferred between objects at different temperatures; it flows from a high to a low temperature. Chemical and physical processes can absorb heat (endothermic) or release heat (exothermic). The SI unit of energy, heat, and work is the joule (J). Specific heat and heat capacity are measures of the energy needed to change the temperature of a substance or object. The amount of heat absorbed or released by a substance depends directly on the type of substance, its mass, and the temperature change it undergoes.

Key Equations

- $q = c \times m \times \Delta T = c \times m \times (T_{\text{final}} - T_{\text{initial}})$

Glossary

calorie (cal)

unit of heat or other energy; the amount of energy required to raise 1 gram of water by 1 degree Celsius; 1 cal is defined as 4.184 J

endothermic process

chemical reaction or physical change that absorbs heat

energy

capacity to supply heat or do work

exothermic process

chemical reaction or physical change that releases heat

heat (q)

transfer of thermal energy between two bodies

heat capacity (C)

extensive property of a body of matter that represents the quantity of heat required to increase its temperature by 1 degree Celsius (or 1 kelvin)

joule (J)

SI unit of energy; 1 joule is the kinetic energy of an object with a mass of 2 kilograms moving with a velocity of 1 meter per second, 1 J = 1 kg m^2/s and 4.184 J = 1 cal

kinetic energy

energy of a moving body, in joules, equal to $\frac{1}{2}mv^2$ (where m = mass and v = velocity)

potential energy

energy of a particle or system of particles derived from relative position, composition, or condition

specific heat capacity (*c*)

intensive property of a substance that represents the quantity of heat required to raise the temperature of 1 gram of the substance by 1 degree Celsius (or 1 kelvin)

temperature

intensive property of matter that is a quantitative measure of “hotness” and “coldness”

thermal energy

kinetic energy associated with the random motion of atoms and molecules

thermochemistry

study of measuring the amount of heat absorbed or released during a chemical reaction or a physical change

work (*w*)

energy transfer due to changes in external, macroscopic variables such as pressure and volume; or causing matter to move against an opposing force

---

This page titled 5.2: Energy Basics is shared under a CC BY license and was authored, remixed, and/or curated by OpenStax.

- **5.2: Energy Basics** by OpenStax is licensed CC BY 4.0. Original source: https://openstax.org/details/books/chemistry-2e.

5.3: Calorimetry

Learning Objectives

- Explain the technique of calorimetry
- Calculate and interpret heat and related properties using typical calorimetry data

One technique we can use to measure the amount of heat involved in a chemical or physical process is known as calorimetry. Calorimetry is used to measure amounts of heat transferred to or from a substance. To do so, the heat is exchanged with a calibrated object (calorimeter). The change in temperature of the measuring part of the calorimeter is converted into the amount of heat (since the previous calibration was used to establish its heat capacity). The measurement of heat transfer using this approach requires the definition of a system (the substance or substances undergoing the chemical or physical change) and its surroundings (the other components of the measurement apparatus that serve to either provide heat to the system or absorb heat from the system). Knowledge of the heat capacity of the surroundings, and careful measurements of the masses of the system and surroundings and their temperatures before and after the process allows one to calculate the heat transferred as described in this section.

A calorimeter is a device used to measure the amount of heat involved in a chemical or physical process. For example, when an exothermic reaction occurs in solution in a calorimeter, the heat produced by the reaction is absorbed by the solution, which increases its temperature. When an endothermic reaction occurs, the heat required is absorbed from the thermal energy of the solution, which decreases its temperature (Figure **5.3.1**). The temperature change, along with the specific heat and mass of the solution, can then be used to calculate the amount of heat involved in either case.

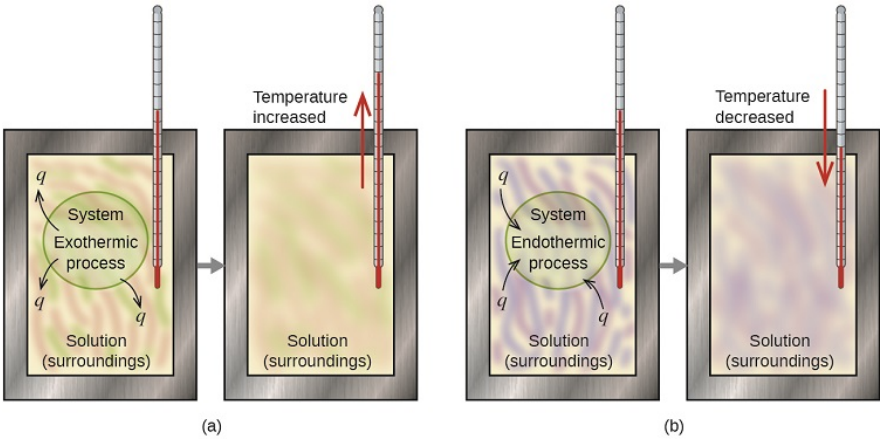

Figure **5.3.1**: In a calorimetric determination, either (a) an exothermic process occurs and heat, q, is negative, indicating that thermal energy is transferred from the system to its surroundings, or (b) an endothermic process occurs and heat, q, is positive, indicating that thermal energy is transferred from the surroundings to the system.

Two diagrams labeled a and b are shown. Each is made up of two rectangular containers with a thermometer inserted into the top right and extending inside. There is a right facing arrow connecting each box in each diagram. The left container in diagram a depicts a pink and green swirling solution with the terms “Exothermic process” and “System” written in the center with arrows facing away from the terms pointing to “q.” The labels “Solution” and “Surroundings” are written at the bottom of the container. The right container in diagram a has the term “Solution” written at the bottom of the container and a red arrow facing up near the thermometer with the phrase “Temperature increased” next to it. The pink and green swirls are more blended in this container. The left container in diagram b depicts a purple and blue swirling solution with the terms “Endothermic process” and “System” written in the center with arrows facing away from the terms and “Solution” and “Surroundings” written at the bottom. The arrows point away from the letter “q.” The right container in diagram b has the term “Solution” written at the bottom and a red arrow facing down near the thermometer with the phrase “Temperature decreased” next to it. The blue and purple swirls are more blended in this container.

By convention, q is given a negative (-) sign when the system releases heat to the surroundings (exothermic); q is given a positive (+) sign when the system absorbs heat from the surroundings (endothermic).

Scientists use well-insulated calorimeters that all but prevent the transfer of heat between the calorimeter and its environment. This enables the accurate determination of the heat involved in chemical processes, the energy content of foods, and so on. General chemistry students often use simple calorimeters constructed from polystyrene cups (Figure **5.3.2**). These easy-to-use “coffee cup” calorimeters allow more heat exchange with their surroundings, and therefore produce less accurate energy values.

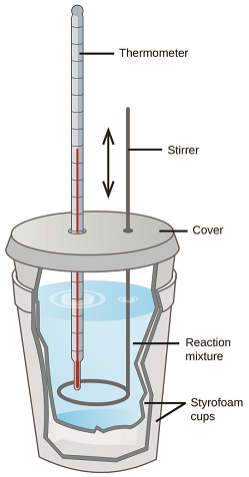

Figure 5.3.2: A simple calorimeter can be constructed from two polystyrene cups. A thermometer and stirrer extend through the cover into the reaction mixture.

Two Styrofoam cups are shown nested in one another with a cover over the top. A thermometer and stirring rod are inserted through the cover and into the solution inside the cup, which is shown as a cut-away. The stirring rod has a double headed arrow next to it facing up and down. The liquid mixture inside the cup is labeled “Reaction mixture.”

Commercial solution calorimeters are also available. Relatively inexpensive calorimeters often consist of two thin-walled cups that are nested in a way that minimizes thermal contact during use, along with an insulated cover, handheld stirrer, and simple thermometer. More expensive calorimeters used for industry and research typically have a well-insulated, fully enclosed reaction vessel, motorized stirring mechanism, and a more accurate temperature sensor (Figure 5.3.3).

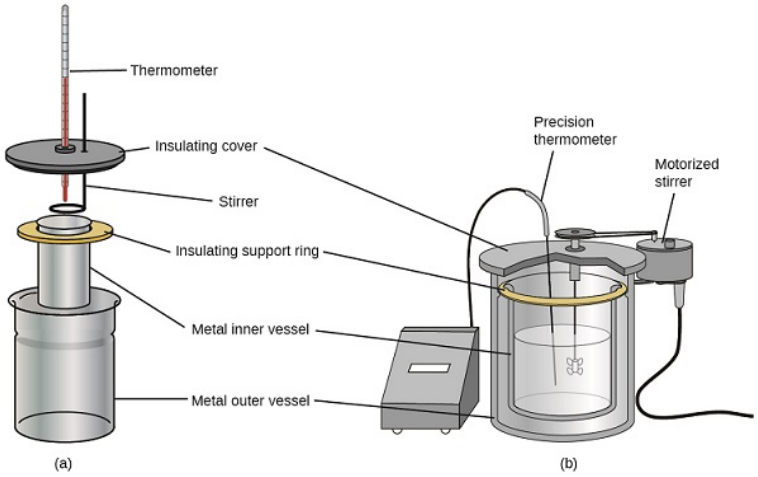

Figure 5.3.3: Commercial solution calorimeters range from (a) simple, inexpensive models for student use to (b) expensive, more accurate models for industry and research.

Two diagrams are shown and labeled a and b. Diagram a depicts a thermometer which passes through a disk-like insulating cover and into a metal cylinder which is labeled “metal inner vessel,” which is in turn nested in a metal cylinder labeled “metal outer vessel.” The inner cylinder rests on an insulating support ring. A stirrer passes through the insulating cover and into the inner cylinder as well. Diagram b shows an inner metal vessel half full of liquid resting on an insulating support ring and nested in a metal outer vessel. A precision temperature probe and motorized stirring rod are placed into the solution in the inner vessel and connected by wires to equipment exterior to the set-up.

Before we practice calorimetry problems involving chemical reactions, consider a simple example that illustrates the core idea behind calorimetry. Suppose we initially have a high-temperature substance, such as a hot piece of metal (M), and a low-temperature substance, such as cool water (W). If we place the metal in the water, heat will flow from M to W. The temperature of M will decrease, and the temperature of W will increase, until the two substances have the same temperature—that is, when they reach thermal equilibrium (Figure 5.3.4). If this occurs in a calorimeter, ideally all of this heat transfer occurs between the two substances, with no heat gained or lost by either the calorimeter or the calorimeter’s surroundings. Under these ideal circumstances, the net heat change is zero:

$$q_{\text{substance M}} + q_{\text{substance W}} = 0 \tag{5.3.1}$$

This relationship can be rearranged to show that the heat gained by substance M is equal to the heat lost by substance W:

$$q_{\text{substance M}} = -q_{\text{substance W}} \tag{5.3.2}$$

The magnitude of the heat (change) is therefore the same for both substances, and the negative sign merely shows that $q_{substance\ M}$ and $q_{substance\ W}$ are opposite in direction of heat flow (gain or loss) but does not indicate the arithmetic sign of either q value (that is determined by whether the matter in question gains or loses heat, per definition). In the specific situation described, $q_{substance\ M}$ is a negative value and $q_{substance\ W}$ is positive, since heat is transferred from M to W.

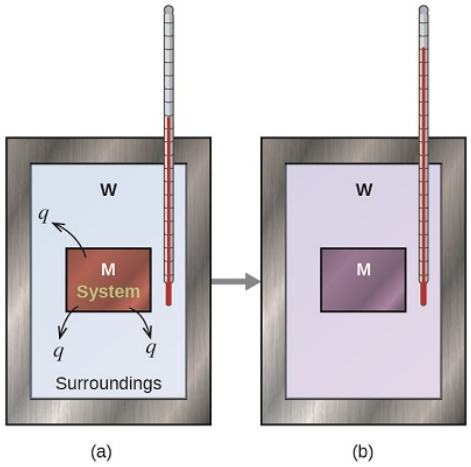

Figure **5.3.4**: In a simple calorimetry process, (a) heat, q, is transferred from the hot metal, M, to the cool water, W, until (b) both are at the same temperature.

Two diagrams are shown and labeled a and b. Each diagram is composed of a rectangular container with a thermometer inserted inside from the top right corner. Both containers are connected by a right-facing arrow. Both containers are full of water, which is depicted by the letter "W," and each container has a square in the middle which represents a metal which is labeled with a letter "M." In diagram a, the metal is drawn in brown and has three arrows facing away from it. Each arrow has the letter "q" at its end. The metal is labeled "system" and the water is labeled "surroundings." The thermometer in this diagram has a relatively low reading. In diagram b, the metal is depicted in purple and the thermometer has a relatively high reading.

Example 5.3.1: Heat Transfer between Substances at Different Temperatures

A hot 360-g piece of rebar (a steel rod used for reinforcing concrete) is dropped into 425 mL of water at 24.0 °C. The final temperature of the water is measured as 42.7 °C. Calculate the initial temperature of the piece of rebar. Assume the specific heat of steel is approximately the same as that for iron (Table T4), and that all heat transfer occurs between the rebar and the water (there is no heat exchange with the surroundings).

Solution

The temperature of the water increases from 24.0 °C to 42.7 °C, so the water absorbs heat. That heat came from the piece of rebar, which initially was at a higher temperature. Assuming that all heat transfer was between the rebar and the water, with no heat "lost" to the surroundings, then heat given off by rebar = − heat taken in by water, or:

$$q_{\text{rebar}} = -q_{\text{water}}$$

Since we know how heat is related to other measurable quantities, we have:

$$(c \times m \times \Delta T)_{\text{rebar}} = -(c \times m \times \Delta T)_{\text{water}}$$

Letting f = final and i = initial, in expanded form, this becomes:

$$c_{\text{rebar}} \times m_{\text{rebar}} \times (T_{\text{f,rebar}} - T_{\text{i,rebar}}) = -c_{\text{water}} \times m_{\text{water}} \times (T_{\text{f,water}} - T_{\text{i,water}})$$

The density of water is 1.0 g/mL, so 425 mL of water = 425 g. Noting that the final temperature of both the rebar and water is 42.7 °C, substituting known values yields:

$$(0.449\ \text{J/g °C})(360\text{g})(42.7\text{°C} - T_{\text{i,rebar}}) = -(4.184\ \text{J/g °C})(425\ \text{g})(42.7\text{°C} - 24.0\text{°C})$$

$$T_{\text{i,rebar}} = \frac{(4.184\ \text{J/g °C})(425\ \text{g})(42.7\text{°C} - 24.0\text{°C})}{(0.449\ \text{J/g °C})(360\ \text{g})} + 42.7\text{°C}$$

Solving this gives Ti,rebar= 248 °C, so the initial temperature of the rebar was 248 °C.

Exercise 5.3.1A

A 248-g piece of copper is dropped into 390 mL of water at 22.6 °C. The final temperature of the water was measured as 39.9 °C. Calculate the initial temperature of the piece of copper. Assume that all heat transfer occurs between the copper and the water.

Answer

The initial temperature of the copper was 335.6 °C.

Exercise 5.3.1B

A 248-g piece of copper initially at 314 °C is dropped into 390 mL of water initially at 22.6 °C. Assuming that all heat transfer occurs between the copper and the water, calculate the final temperature.

Answer

The final temperature (reached by both copper and water) is 38.7 °C.

This method can also be used to determine other quantities, such as the specific heat of an unknown metal.

Example 5.3.2: Identifying a Metal by Measuring Specific Heat

A 59.7 g piece of metal that had been submerged in boiling water was quickly transferred into 60.0 mL of water initially at 22.0 °C. The final temperature is 28.5 °C. Use these data to determine the specific heat of the metal. Use this result to identify the metal.

Solution

Assuming perfect heat transfer, heat given off by metal = −heat taken in by water, or:

$$q_{\text{metal}} = -q_{\text{water}}$$

In expanded form, this is:

$$c_{\text{metal}} \times m_{\text{metal}} \times (T_{\text{f,metal}} - T_{\text{i,metal}}) = -c_{\text{water}} \times m_{\text{water}} \times (T_{\text{f,water}} - T_{\text{i,water}})$$

Noting that since the metal was submerged in boiling water, its initial temperature was 100.0 °C; and that for water, 60.0 mL = 60.0 g; we have:

$$(c_{\text{metal}})(59.7\ \text{g})(28.5°\text{C} - 100.0°\text{C}) = -(4.18\ \text{J/g °C})(60.0\ \text{g})(28.5°\text{C} - 22.0°\text{C})$$

Solving this:

$$c_{\text{metal}} = \frac{-(4.184\ \text{J/g °C})(60.0\ \text{g})(6.5°\text{C})}{(59.7\ \text{g})(-71.5°\text{C})} = 0.38\ \text{J/g °C}$$

Comparing this with values in Table T4, our experimental specific heat is closest to the value for copper (0.39 J/g °C), so we identify the metal as copper.

Exercise 5.3.2

A 92.9-g piece of a silver/gray metal is heated to 178.0 °C, and then quickly transferred into 75.0 mL of water initially at 24.0 °C. After 5 minutes, both the metal and the water have reached the same temperature: 29.7 °C. Determine the specific heat and the identity of the metal. (Note: You should find that the specific heat is close to that of two different metals. Explain how you can confidently determine the identity of the metal).

Answer

$c_{metal} = 0.13\ J/g\ °C$

This specific heat is close to that of either gold or lead. It would be difficult to determine which metal this was based solely on the numerical values. However, the observation that the metal is silver/gray in addition to the value for the specific heat indicates that the metal is lead.

When we use calorimetry to determine the heat involved in a chemical reaction, the same principles we have been discussing apply. The amount of heat absorbed by the calorimeter is often small enough that we can neglect it (though not for highly accurate measurements, as discussed later), and the calorimeter minimizes energy exchange with the surroundings. Because energy is neither created nor destroyed during a chemical reaction, there is no overall energy change during the reaction. The heat produced or consumed in the reaction (the "system"), q_{reaction}, plus the heat absorbed or lost by the solution (the "surroundings"), $q_{solution}$, must add up to zero:

$$q_{\text{reaction}} + q_{\text{solution}} = 0 \tag{5.3.3}$$

This means that the amount of heat produced or consumed in the reaction equals the amount of heat absorbed or lost by the solution:

$$q_{\text{reaction}} = -q_{\text{solution}} \tag{5.3.4}$$

This concept lies at the heart of all calorimetry problems and calculations.

Example 5.3.3: Heat Produced by an Exothermic Reaction

When 50.0 mL of 0.10 M HCl(*aq*) and 50.0 mL of 1.00 M NaOH(*aq*), both at 22.0 °C, are added to a coffee cup calorimeter, the temperature of the mixture reaches a maximum of 28.9 °C. What is the approximate amount of heat produced by this reaction?

$$\text{HCl}(aq) + \text{NaOH}(aq) \longrightarrow \text{NaCl}(aq) + \text{H}_2\text{O}(l)$$

Solution

To visualize what is going on, imagine that you could combine the two solutions so quickly that no reaction took place while they mixed; then after mixing, the reaction took place. At the instant of mixing, you have 100.0 mL of a mixture of HCl and NaOH at 22.0 °C. The HCl and NaOH then react until the solution temperature reaches 28.9 °C.

The heat given off by the reaction is equal to that taken in by the solution. Therefore:

$$q_{\text{reaction}} = -q_{\text{solution}}$$

(It is important to remember that this relationship only holds if the calorimeter does not absorb any heat from the reaction, and there is no heat exchange between the calorimeter and its surroundings.)

Next, we know that the heat absorbed by the solution depends on its specific heat, mass, and temperature change:

$$q_{\text{solution}} = (c \times m \times \Delta T)_{\text{solution}}$$

To proceed with this calculation, we need to make a few more reasonable assumptions or approximations. Since the solution is aqueous, we can proceed as if it were water in terms of its specific heat and mass values. The density of water is approximately 1.0 g/mL, so 100.0 mL has a mass of about 1.0×10^2 g (two significant figures). The specific heat of water is approximately 4.18 J/g °C, so we use that for the specific heat of the solution. Substituting these values gives:

$$q_{\text{solution}} = (4.184\ \text{J/g °C})(1.0 \times 10^2\ \text{g})(28.9\text{°C} - 22.0\text{°C}) = 2.89 \times 10^3\ \text{J}$$

Finally, since we are trying to find the heat of the reaction, we have:

$$q_{\text{reaction}} = -q_{\text{solution}} = -2.89 \times 10^3\ J$$

The negative sign indicates that the reaction is exothermic. It produces 2.89 kJ of heat.

Exercise 5.3.3

When 100 mL of 0.200 M NaCl(*aq*) and 100 mL of 0.200 M $AgNO_3$(*aq*), both at 21.9 °C, are mixed in a coffee cup calorimeter, the temperature increases to 23.5 °C as solid AgCl forms. How much heat is produced by this precipitation reaction? What assumptions did you make to determine your value?

Answer

$1.34 \times 10^3\ J$; assume no heat is absorbed by the calorimeter, no heat is exchanged between the calorimeter and its surroundings, and that the specific heat and mass of the solution are the same as those for water

Thermochemistry of Hand Warmers

When working or playing outdoors on a cold day, you might use a hand warmer to warm your hands (Figure 5.3.5). A common reusable hand warmer contains a supersaturated solution of $NaC_2H_3O_2$ (sodium acetate) and a metal disc. Bending the disk creates nucleation sites around

which the metastable $NaC_2H_3O_2$ quickly crystallizes (a later chapter on solutions will investigate saturation and supersaturation in more detail).

The process $\mathbf{NaC_2H_3O_2}(aq) \longrightarrow \mathbf{NaC_2H_3O_2}(s)$ is exothermic, and the heat produced by this process is absorbed by your hands, thereby warming them (at least for a while). If the hand warmer is reheated, the $NaC_2H_3O_2$ redissolves and can be reused.

Figure **5.3.5**: Chemical hand warmers produce heat that warms your hand on a cold day. In this one, you can see the metal disc that initiates the exothermic precipitation reaction. (credit: modification of work by Science Buddies TV/YouTube)

A series of three photos is shown. There are two right-facing arrows connecting one photo to the next. The first photo shows a chemical hand warmer. It is a bag that contains a clear, colorless liquid. There is a white disk located to the right inside the bag. The second photo shows the same thing, except the white disc has become a white, cloudy substance. The third photo shows the entire bag filled with this white substance.

Another common hand warmer produces heat when it is ripped open, exposing iron and water in the hand warmer to oxygen in the air. One simplified version of this exothermic reaction is

$$2\,\mathrm{Fe}\,(s) + \tfrac{3}{2}\,\mathrm{O_2}\,(g) \longrightarrow \mathrm{Fe_2O_3}\,(s).\ n$$

Salt in the hand warmer catalyzes the reaction, so it produces heat more rapidly; cellulose, vermiculite, and activated carbon help distribute the heat evenly. Other types of hand warmers use lighter fluid (a platinum catalyst helps lighter fluid oxidize exothermically), charcoal (charcoal oxidizes in a special case), or electrical units that produce heat by passing an electrical current from a battery through resistive wires.

✔ Example **5.3.4**: Heat Flow in an Instant Ice Pack

When solid ammonium nitrate dissolves in water, the solution becomes cold. This is the basis for an "instant ice pack" (Figure **5.3.5**). When 3.21 g of solid NH_4NO_3 dissolves in 50.0 g of water at 24.9 °C in a calorimeter, the temperature decreases to 20.3 °C.

Calculate the value of q for this reaction and explain the meaning of its arithmetic sign. State any assumptions that you made.

Figure **5.3.5**: An instant cold pack consists of a bag containing solid ammonium nitrate and a second bag of water. When the bag of water is broken, the pack becomes cold because the dissolution of ammonium nitrate is an endothermic process that removes thermal energy from the water. The cold pack then removes thermal energy from your body.

Solution

We assume that the calorimeter prevents heat transfer between the solution and its external environment (including the calorimeter itself), in which case:

$$q_{\mathrm{rxn}} = -q_{\mathrm{soln}}$$

with "rxn" and "soln" used as shorthand for "reaction" and "solution," respectively.

Assuming also that the specific heat of the solution is the same as that for water, we have:

$$\begin{aligned} q_{rxn} &= -q_{soln} = -(c \times m \times \Delta T)_{soln} \\ &= -[(4.184 J/g\,°C) \times (53.2\,g) \times (20.3°C - 24.9°C)] \\ &= -[(4.184 J/g\,°C) \times (53.2\,g) \times (-4.6°C)] \\ &+ 1.0 \times 10^3\,J = +1.0\,kJ \end{aligned}$$

The positive sign for q indicates that the dissolution is an endothermic process.

? Exercise 5.3.4

When a 3.00-g sample of KCl was added to 3.00 × 10^2 g of water in a coffee cup calorimeter, the temperature decreased by 1.05 °C. How much heat is involved in the dissolution of the KCl? What assumptions did you make?

Answer

1.33 kJ; assume that the calorimeter prevents heat transfer between the solution and its external environment (including the calorimeter itself) and that the specific heat of the solution is the same as that for water.

If the amount of heat absorbed by a calorimeter is too large to neglect or if we require more accurate results, then we must take into account the heat absorbed both by the solution and by the calorimeter.

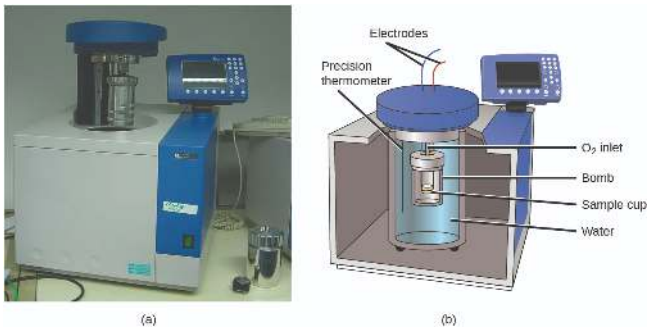

Figure 5.3.6: (a) A bomb calorimeter is used to measure heat produced by reactions involving gaseous reactants or products, such as combustion. (b) The reactants are contained in the gas-tight "bomb," which is submerged in water and surrounded by insulating materials. (credit a: modification of work by "Harbor1"/Wikimedia commons)

A picture and a diagram are shown, labeled a and b, respectively. Picture a depicts a bomb calorimeter. It is a cube-shaped machine with a cavity in the top, a metal cylinder that is above the cavity, and a read-out panel attached to the top-right side. Diagram b depicts a cut away figure of a cube with a cylindrical container full of water in the middle of it. Another container, labeled "bomb," sits inside of a smaller cylinder which holds a sample cup and is nested in the cylindrical container surrounded by the water. A black line extends into the water and is labeled "Precision thermometer." Two wires labeled "Electrodes" extend away from a cover that sits on top of the interior container. A read-out panel is located at the top right of the cube.

The calorimeters described are designed to operate at constant (atmospheric) pressure and are convenient to measure heat flow accompanying processes that occur in solution. A different type of calorimeter that operates at constant volume, colloquially known as a bomb calorimeter, is used to measure the energy produced by reactions that yield large amounts of heat and gaseous products, such as combustion reactions. (The term "bomb" comes from the observation that these reactions can be vigorous enough to resemble explosions that would damage other calorimeters.) This type of calorimeter consists of a robust steel container (the "bomb") that contains the reactants and is itself submerged in water (Figure 5.3.6). The sample is placed in the bomb, which is then filled with oxygen at high pressure. A small electrical spark is used to ignite the sample. The energy produced by the reaction is trapped in the steel bomb and the surrounding water. The temperature increase is measured and, along with the known heat capacity of the calorimeter, is used to calculate the energy produced by the reaction. Bomb calorimeters require calibration to determine the heat capacity of the calorimeter and ensure accurate results. The calibration is accomplished using a reaction with a known q, such as a measured quantity of benzoic acid ignited by a spark from a nickel fuse wire that is weighed before and after the reaction. The temperature change produced by the known reaction is used to determine the heat capacity of the calorimeter. The calibration is generally performed each time before the calorimeter is used to gather research data.



Video 5.3.1: Video of view how a bomb calorimeter is prepared for action.

Example 5.3.5: Bomb Calorimetry

When 3.12 g of glucose, $C_6H_{12}O_6$, is burned in a bomb calorimeter, the temperature of the calorimeter increases from 23.8 °C to 35.6 °C. The calorimeter contains 775 g of water, and the bomb itself has a heat capacity of 893 J/°C. How much heat was produced by the combustion of the glucose sample?

Solution

The combustion produces heat that is primarily absorbed by the water and the bomb. (The amounts of heat absorbed by the reaction products and the unreacted excess oxygen are relatively small and dealing with them is beyond the scope of this text. We will neglect them in our calculations.)

The heat produced by the reaction is absorbed by the water and the bomb:

$$\begin{aligned} q_{rxn} &= -(q_{water} + q_{bomb}) \\ &= -[(4.184\ J/g\ °C) \times (775\ g) \times (35.6°C - 23.8°C) + 893\ J/°C \times (35.6°C - 23.8°C)] \\ &= -(38,300\ J + 10,500\ J) \\ &= -48,800\ J = -48.8\ kJ \end{aligned}$$

This reaction released 48.7 kJ of heat when 3.12 g of glucose was burned.

Exercise 5.3.5

When 0.963 g of benzene, C_6H_6, is burned in a bomb calorimeter, the temperature of the calorimeter increases by 8.39 °C. The bomb has a heat capacity of 784 J/°C and is submerged in 925 mL of water. How much heat was produced by the combustion of the glucose sample?

Answer

39.0 kJ

Since the first one was constructed in 1899, 35 calorimeters have been built to measure the heat produced by a living person.[1] These whole-body calorimeters of various designs are large enough to hold an individual human being. More recently, whole-room calorimeters allow for relatively normal activities to be performed, and these calorimeters generate data that more closely reflect the real world. These calorimeters are used to measure the metabolism of individuals under different environmental conditions, different dietary regimes, and with different health conditions, such as diabetes. In humans, metabolism is typically measured in Calories per day. A nutritional calorie (Calorie) is the energy unit used to quantify the amount of energy derived from the metabolism of foods; one Calorie is equal to 1000 calories (1 kcal), the amount of energy needed to heat 1 kg of water by 1 °C.

Measuring Nutritional Calories

In your day-to-day life, you may be more familiar with energy being given in Calories, or nutritional calories, which are used to quantify the amount of energy in foods. One calorie (cal) = exactly 4.184 joules, and one Calorie (note the capitalization) = 1000 cal, or 1 kcal. (This is approximately the amount of energy needed to heat 1 kg of water by 1 °C.)

The macronutrients in food are proteins, carbohydrates, and fats or oils. Proteins provide about 4 Calories per gram, carbohydrates also provide about 4 Calories per gram, and fats and oils provide about 9 Calories/g. Nutritional labels on food packages show the caloric content of one serving of the food, as well as the breakdown into Calories from each of the three macronutrients (Figure **5.3.7**).

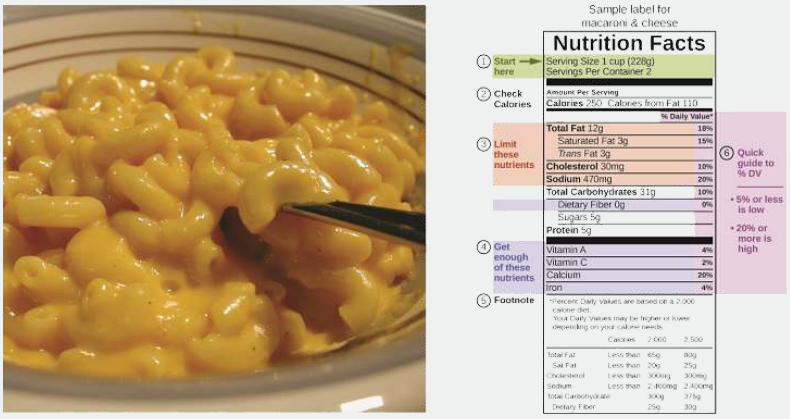

(a) (b)

Figure **5.3.7**: (a) Macaroni and cheese contain energy in the form of the macronutrients in the food. (b) The food's nutritional information is shown on the package label. In the US, the energy content is given in Calories (per serving); the rest of the world usually uses kilojoules. (credit a: modification of work by "Rex Roof"/Flickr)

For the example shown in (b), the total energy per 228-g portion is calculated by:

$$(5\text{ g protein} \times 4\text{ Calories/g}) + (31\text{ g carb} \times 4\text{ Calories/g}) + (12\text{ g fat} \times 9\text{ Calories/g}) = 252\text{ Calories} \quad (5.3.5)$$

So, you can use food labels to count your Calories. But where do the values come from? And how accurate are they? The caloric content of foods can be determined by using bomb calorimetry; that is, by burning the food and measuring the energy it contains. A sample of food is weighed, mixed in a blender, freeze-dried, ground into powder, and formed into a pellet. The pellet is burned inside a bomb calorimeter, and the measured temperature change is converted into energy per gram of food.

Today, the caloric content on food labels is derived using a method called the Atwater system that uses the average caloric content of the different chemical constituents of food, protein, carbohydrate, and fats. The average amounts are those given in the equation and are derived from the various results given by bomb calorimetry of whole foods. The carbohydrate amount is discounted a certain amount for the fiber content, which is indigestible carbohydrate. To determine the energy content of a food, the quantities of carbohydrate, protein, and fat are each multiplied by the average Calories per gram for each and the products summed to obtain the total energy.

Summary

Calorimetry is used to measure the amount of thermal energy transferred in a chemical or physical process. This requires careful measurement of the temperature change that occurs during the process and the masses of the system and surroundings. These measured quantities are then used to compute the amount of heat produced or consumed in the process using known mathematical relations. Calorimeters are designed to minimize energy exchange between the system being studied and its surroundings. They range from simple coffee cup calorimeters used by introductory chemistry students to sophisticated bomb calorimeters used to determine the energy content of food.

Footnotes

1. 1 Francis D. Reardon et al. "The Snellen human calorimeter revisited, re-engineered and upgraded: Design and performance characteristics." *Medical and Biological Engineering and Computing* 8 (2006)721–28, The Snellen human calorimeter revisited, re-engineered and upgraded: design and performance characteristics [link.springer.com].

Glossary

bomb calorimeter

device designed to measure the energy change for processes occurring under conditions of constant volume; commonly used for reactions involving solid and gaseous reactants or products

calorimeter
device used to measure the amount of heat absorbed or released in a chemical or physical process

calorimetry
process of measuring the amount of heat involved in a chemical or physical process

nutritional calorie (Calorie)
unit used for quantifying energy provided by digestion of foods, defined as 1000 cal or 1 kcal

surroundings
all matter other than the system being studied

system
portion of matter undergoing a chemical or physical change being studied

---

This page titled 5.3: Calorimetry is shared under a CC BY license and was authored, remixed, and/or curated by OpenStax.

- **5.3: Calorimetry** by OpenStax is licensed CC BY 4.0. Original source: https://openstax.org/details/books/chemistry-2e.

5.4: Enthalpy

Skills to Develop

- State the first law of thermodynamics
- Define enthalpy and explain its classification as a state function
- Write and balance thermochemical equations
- Calculate enthalpy changes for various chemical reactions
- Explain Hess's law and use it to compute reaction enthalpies

Thermochemistry is a branch of chemical thermodynamics, the science that deals with the relationships between heat, work, and other forms of energy in the context of chemical and physical processes. As we concentrate on thermochemistry in this chapter, we need to consider some widely used concepts of thermodynamics.

Substances act as reservoirs of energy, meaning that energy can be added to them or removed from them. Energy is stored in a substance when the kinetic energy of its atoms or molecules is raised. The greater kinetic energy may be in the form of increased translations (travel or straight-line motions), vibrations, or rotations of the atoms or molecules. When thermal energy is lost, the intensities of these motions decrease and the kinetic energy falls. The total of all possible kinds of energy present in a substance is called the internal energy (U), sometimes symbolized as E.

As a system undergoes a change, its internal energy can change, and energy can be transferred from the system to the surroundings, or from the surroundings to the system. Energy is transferred into a system when it absorbs heat (q) from the surroundings or when the surroundings do work (w) on the system. For example, energy is transferred into room-temperature metal wire if it is immersed in hot water (the wire absorbs heat from the water), or if you rapidly bend the wire back and forth (the wire becomes warmer because of the work done on it). Both processes increase the internal energy of the wire, which is reflected in an increase in the wire's temperature. Conversely, energy is transferred out of a system when heat is lost from the system, or when the system does work on the surroundings.

The relationship between internal energy, heat, and work can be represented by the equation:

$$\Delta U = q + w \tag{5.4.1}$$

as shown in Figure **5.4.1**. This is one version of the first law of thermodynamics, and it shows that the internal energy of a system changes through heat flow into or out of the system (positive q is heat flow in; negative q is heat flow out) or work done on or by the system. The work, w, is positive if it is done on the system and negative if it is done by the system.

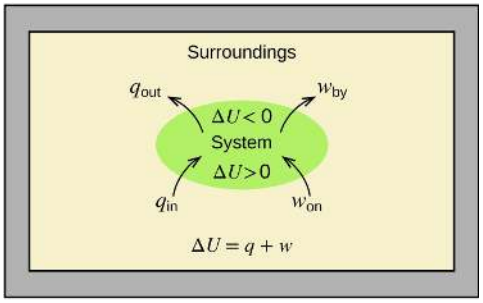

Figure **5.4.1**: The internal energy, U, of a system can be changed by heat flow and work. If heat flows into the system, q_{in}, or work is done on the system, w_{on}, its internal energy increases, $\Delta U > 0$. If heat flows out of the system, q_{out}, or work is done by the system, w_{by}, its internal energy decreases, $\Delta U < 0$.

A type of work called expansion work (or pressure-volume work) occurs when a system pushes back the surroundings against a restraining pressure, or when the surroundings compress the system. An example of this occurs during the operation of an internal combustion engine. The reaction of gasoline and oxygen is exothermic. Some of this energy is given off as heat, and some does work pushing the piston in the cylinder. The substances involved in the reaction are the system, and the engine and the rest of the universe are the surroundings. The system loses energy by both heating and doing work on the surroundings, and its internal energy decreases. (The engine is able to keep the car moving because this process is repeated many times per second while the engine is

running.) We will consider how to determine the amount of work involved in a chemical or physical change in the chapter on thermodynamics.

As discussed, the relationship between internal energy, heat, and work can be represented as $\Delta U = q + w$. Internal energy is a type of quantity known as a state function (or state variable), whereas heat and work are not state functions. The value of a state function depends only on the state that a system is in, and not on how that state is reached. If a quantity is not a state function, then its value *does* depend on how the state is reached. An example of a state function is altitude or elevation. If you stand on the summit of Mt. Kilimanjaro, you are at an altitude of 5895 m, and it does not matter whether you hiked there or parachuted there. The distance you traveled to the top of Kilimanjaro, however, is not a state function. You could climb to the summit by a direct route or by a more roundabout, circuitous path (Figure **5.4.2**). The distances traveled would differ (distance is not a state function) but the elevation reached would be the same (altitude is a state function).

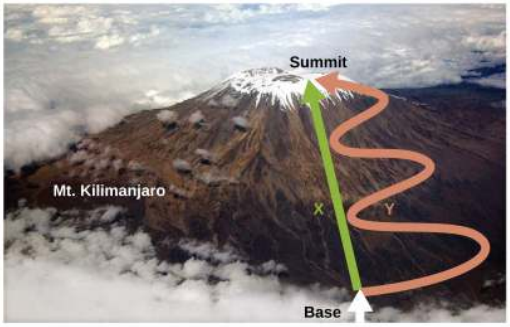

Figure **5.4.2**: Paths X and Y represent two different routes to the summit of Mt. Kilimanjaro. Both have the same change in elevation (altitude or elevation on a mountain is a state function; it does not depend on path), but they have very different distances traveled (distance walked is not a state function; it depends on the path). (credit: modification of work by Paul Shaffner)

Chemists ordinarily use a property known as enthalpy (H) to describe the thermodynamics of chemical and physical processes. Enthalpy is defined as the sum of a system's internal energy (U) and the mathematical product of its pressure (P) and volume (V):

$$H = U + PV \tag{5.4.2}$$

Since it is derived from three state functions (U, P, and V), enthalpy is also a state function. Enthalpy values for specific substances cannot be measured directly; only enthalpy changes for chemical or physical processes can be determined. For processes that take place at constant pressure (a common condition for many chemical and physical changes), the enthalpy change (ΔH) is:

$$\Delta H = \Delta U + P\Delta V \tag{5.4.3}$$

The mathematical product $P\Delta V$ represents work (w), namely, expansion or pressure-volume work as noted. By their definitions, the arithmetic signs of ΔV and w will always be opposite:

$$P\Delta V = -w \tag{5.4.4}$$

Substituting Equation 5.4.4 and the definition of internal energy (Equation 5.4.1) into Equation 5.4.3 yields:

$$\Delta H = \Delta U + P\Delta V \tag{5.4.5}$$

$$= q_p + \cancel{w} - \cancel{w} \tag{5.4.6}$$

$$= q_p \tag{5.4.7}$$

where q_p is the heat of reaction under conditions of constant pressure.

And so, if a chemical or physical process is carried out at constant pressure with the only work done caused by expansion or contraction, then the heat flow (q_p) and enthalpy change (ΔH) for the process are equal.

The heat given off when you operate a Bunsen burner is equal to the enthalpy change of the methane combustion reaction that takes place, since it occurs at the essentially constant pressure of the atmosphere. On the other hand, the heat produced by a reaction measured in a bomb calorimeter is not equal to ΔH because the closed, constant-volume metal container prevents expansion work from occurring. Chemists usually perform experiments under normal atmospheric conditions, at constant external pressure with $q = \Delta H$, which makes enthalpy the most convenient choice for determining heat.

The following conventions apply when we use ΔH:

1. Chemists use a thermochemical equation to represent the changes in both matter and energy. In a thermochemical equation, the enthalpy change of a reaction is shown as a ΔH value following the equation for the reaction. This ΔH value indicates the amount of heat associated with the reaction involving the number of moles of reactants and products as shown in the chemical equation. For example, consider this equation:

$$\mathrm{H_2\,(g) + \tfrac{1}{2}\,O_2\,(g) \longrightarrow H_2O\,(l)} \quad \Delta H = -286\ \mathrm{kJ} \tag{5.4.8}$$

   This equation indicates that when 1 mole of hydrogen gas and 12 mole of oxygen gas at some temperature and pressure change to 1 mole of liquid water at the same temperature and pressure, 286 kJ of heat are released to the surroundings. If the coefficients of the chemical equation are multiplied by some factor, the enthalpy change must be multiplied by that same factor (ΔH is an extensive property).

Multiple \label

2. The enthalpy change of a reaction depends on the physical state of the reactants and products of the reaction (whether we have gases, liquids, solids, or aqueous solutions), so these must be shown. For example, when 1 mole of hydrogen gas and 12 mole of oxygen gas change to 1 mole of liquid water at the same temperature and pressure, 286 kJ of heat are released. If gaseous water forms, only 242 kJ of heat are released.

$$\mathrm{H_2\,(g) + \tfrac{1}{2}\,O_2\,(g) \longrightarrow H_2O\,(g)} \quad \Delta H = -242\ k\,\mathrm{J} \tag{5.4.9}$$

3. A negative value of an enthalpy change, ΔH, indicates an exothermic reaction; a positive value of ΔH indicates an endothermic reaction. If the direction of a chemical equation is reversed, the arithmetic sign of its ΔH is changed (a process that is endothermic in one direction is exothermic in the opposite direction).

Example 5.4.1: Measurement of an Enthalpy Change

When 0.0500 mol of HCl(*aq*) reacts with 0.0500 mol of NaOH(*aq*) to form 0.0500 mol of NaCl(*aq*), 2.9 kJ of heat are produced. What is ΔH, the enthalpy change, per mole of acid reacting, for the acid-base reaction run under the conditions described ?

$$\mathrm{HCl\,(aq) + NaOH\,(aq)\ \rightarrow NaCl\,(aq) + H_2O\,(l)} onumber \tag{5.4.10}$$

Solution

For the reaction of 0.0500 mol acid (HCl), q = −2.9 kJ. This ratio

$$\frac{-2.9\ \mathrm{kJ}}{0.0500\ \mathrm{mol\ HCl}} onumber \tag{5.4.11}$$

can be used as a conversion factor to find the heat produced when 1 mole of HCl reacts:

$$\Delta H = 1\ \cancel{\mathrm{mol\ HCl}} \times \frac{-2.9\ \mathrm{kJ}}{0.0500\ \cancel{\mathrm{mol\ HCl}}} = -58\ \mathrm{kJ} onumber \tag{5.4.12}$$

The enthalpy change when 1 mole of HCl reacts is −58 kJ. Since that is the number of moles in the chemical equation, we write the thermochemical equation as:

$$\mathrm{HCl_{(aq)} + NaOH_{(aq)} \longrightarrow NaCl_{(aq)} + H_2O_{(l)}} \quad \Delta H = -58\ \mathrm{kJ} onumber \tag{5.4.13}$$

Exercise 5.4.1

When 1.34 g Zn(s) reacts with 60.0 mL of 0.750 M HCl(aq), 3.14 kJ of heat are produced. Determine the enthalpy change per mole of zinc reacting for the reaction:

$$\mathrm{Zn_{(s)} + 2\,HCl_{(aq)} \longrightarrow ZnCl_{(aq)} + H_{2(g)}} onumber \tag{5.4.14}$$

Answer

ΔH = −153 kJ

Be sure to take both stoichiometry and limiting reactants into account when determining the ΔH for a chemical reaction.

Example 5.4.2: Another Example of the Measurement of an Enthalpy Change

A gummy bear contains 2.67 g sucrose, $C_{12}H_{22}O_{11}$. When it reacts with 7.19 g potassium chlorate, $KClO_3$, 43.7 kJ of heat are produced. Determine the enthalpy change for the reaction

$$C_{12}H_{22}O_{11}(aq) + 8\,KClO_3(aq) \longrightarrow 12\,CO_2(g) + 11\,H_2O(l) + 8\,KCl(aq) onumber \tag{5.4.15}$$

Solution

We have $2.67\ \cancel{g} \times \frac{1\ \text{mol}}{342.3\ \cancel{g}} = 0.00780\ \text{mol}\ C_{12}H_{22}O_{11}$ available, and

$7.19\ \cancel{g} \times \frac{1\ \text{mol}}{122.5\ \cancel{g}} = 0.0587\ \text{mol}\ KClO_3$ available.

Since

$$0.0587\ \text{mol}\ KClO_3 \times \frac{1\ \text{mol}\ C_{12}H_{22}O_{11}}{8\ \text{mol}\ KClO_3} = 0.00734\ \text{mol}\ {}_{12}CH_{22}O_{11}$$

is needed, $C_{12}H_{22}O_{11}$ is the excess reactant and $KClO_3$ is the limiting reactant.

The reaction uses 8 mol $KClO_3$, and the conversion factor is $\frac{-43.7\ \text{kJ}}{0.0587\ \text{mol}\ KClO_3}$, so we have $\Delta H = 8\ \text{mol} \times \frac{-43.7\ \text{kJ}}{0.0587\ \text{mol}\ KClO_3} = -5960\ \text{kJ}$. The enthalpy change for this reaction is −5960 kJ, and the thermochemical equation is:

$$C_{12}H_{22}O_{11} + 8\,KClO_3 \longrightarrow 12\,CO_2 + 11\,H_2O + 8\,KCl \quad \Delta H = -5960\ kJ onumber \tag{5.4.16}$$

Exercise 5.4.2

When 1.42 g of iron reacts with 1.80 g of chlorine, 3.22 g of $FeCl_{2(s)}$ and 8.60 kJ of heat is produced. What is the enthalpy change for the reaction when 1 mole of $FeCl_2\,(s)$ is produced?

Answer

ΔH = −338 kJ

Enthalpy changes are typically tabulated for reactions in which both the reactants and products are at the same conditions. A standard state is a commonly accepted set of conditions used as a reference point for the determination of properties under other different conditions. For chemists, the IUPAC standard state refers to materials under a pressure of 1 bar and solutions at 1 M, and **does not specify a temperature** (it used too). Many thermochemical tables list values with a standard state of 1 atm. Because the ΔH of a reaction changes very little with such small changes in pressure (1 bar = 0.987 atm), ΔH values (except for the most precisely measured values) are essentially the same under both sets of standard conditions. We will include a superscripted "o" in the enthalpy change symbol to designate standard state. Since the usual (but not technically standard) temperature is 298.15 K, we will use a subscripted "298" to designate this temperature. Thus, the symbol (ΔH°_{298}) is used to indicate an enthalpy change for a process occurring under these conditions. (The symbol ΔH is used to indicate an enthalpy change for a reaction occurring under nonstandard conditions.)

The enthalpy changes for many types of chemical and physical processes are available in the reference literature, including those for combustion reactions, phase transitions, and formation reactions. As we discuss these quantities, it is important to pay attention to the *extensive* nature of enthalpy and enthalpy changes. Since the enthalpy change for a given reaction is proportional to the amounts of substances involved, it may be reported on that basis (i.e., as the ΔH for specific amounts of reactants). However, we often find it more useful to divide one extensive property (ΔH) by another (amount of substance), and report a per-amount *intensive* value of ΔH, often "normalized" to a per-mole basis. (Note that this is similar to determining the intensive property specific heat from the extensive property heat capacity, as seen previously.)

Enthalpy of Combustion

Standard enthalpy of combustion (ΔH°_C) is the enthalpy change when 1 mole of a substance burns (combines vigorously with oxygen) under standard state conditions; it is sometimes called "heat of combustion." For example, the enthalpy of combustion of

ethanol, −1366.8 kJ/mol, is the amount of heat produced when one mole of ethanol undergoes complete combustion at 25 °C and 1 atmosphere pressure, yielding products also at 25 °C and 1 atm.

$$\mathrm{C_2H_5OH}(l)+3\,\mathrm{O_2}(g)\longrightarrow 2\,\mathrm{CO_2}+3\,\mathrm{H_2O}(l)\quad \Delta H^\circ_{298}=-1366.8\ \mathrm{kJ} \tag{5.4.17}$$

Enthalpies of combustion for many substances have been measured; a few of these are listed in Table **5.4.1**. Many readily available substances with large enthalpies of combustion are used as fuels, including hydrogen, carbon (as coal or charcoal), and hydrocarbons (compounds containing only hydrogen and carbon), such as methane, propane, and the major components of gasoline.

Table* 5.4.1*: *Standard Molar Enthalpies of Combustion*

Substance	Combustion Reaction	Enthalpy of Combustion $\Delta H_c^\circ\left(\frac{\mathrm{kJ}}{\mathrm{mol}}\ \text{at}\ 25°\mathrm{C}\right)$
carbon	$\mathrm{C}(s)+\mathrm{O_2}(g)\longrightarrow \mathrm{CO_2}(g)$	−393.5
hydrogen	$\mathrm{H_2}(g)+\frac{1}{2}\mathrm{O_2}(g)\longrightarrow \mathrm{H_2O}(l)$	−285.8
magnesium	$\mathrm{Mg}(s)+\frac{1}{2}\mathrm{O_2}(g)\longrightarrow \mathrm{MgO}(s)$	−601.6
sulfur	$\mathrm{S}(s)+\mathrm{O_2}(g)\longrightarrow \mathrm{SO_2}(g)$	−296.8
carbon monoxide	$\mathrm{CO}(g)+\frac{1}{2}\mathrm{O_2}(g)\longrightarrow \mathrm{CO_2}(g)$	−283.0
methane	$\mathrm{CH_4}(g)+2\,\mathrm{O_2}(g)\longrightarrow \mathrm{CO_2}(g)+2\,\mathrm{H_2O}(l)$	−890.8
acetylene	$\mathrm{C_2H_2}(g)+\frac{5}{2}\mathrm{O_2}(g)\longrightarrow 2\,\mathrm{CO_2}(g)+\mathrm{H_2O}(l)$	−1301.1
ethanol	$\mathrm{C_2H_5OH}(l)+3\,\mathrm{O_2}(g)\longrightarrow \mathrm{CO_2}(g)+3\,\mathrm{H_2O}(l)$	−1366.8
methanol	$\mathrm{CH_3OH}(l)+\frac{3}{2}\mathrm{O_2}(g)\longrightarrow \mathrm{CO_2}(g)+2\,\mathrm{H_2O}(l)$	−726.1
isooctane	$\mathrm{C_8H_{18}}(l)+\frac{25}{2}\mathrm{O_2}(g)\longrightarrow 8\,\mathrm{CO_2}(g)+9\,\mathrm{H_2O}(l)$	−5461

Example 5.4.3: Using Enthalpy of Combustion

As Figure **5.4.3** suggests, the combustion of gasoline is a highly exothermic process. Let us determine the approximate amount of heat produced by burning 1.00 L of gasoline, assuming the enthalpy of combustion of gasoline is the same as that of isooctane, a common component of gasoline. The density of isooctane is 0.692 g/mL.

Figure **5.4.3**: The combustion of gasoline is very exothermic. (credit: modification of work by “AlexEagle”/Flickr)

Solution

Starting with a known amount (1.00 L of isooctane), we can perform conversions between units until we arrive at the desired amount of heat or energy. The enthalpy of combustion of isooctane provides one of the necessary conversions. Table **5.4.1** gives this value as −5460 kJ per 1 mole of isooctane (C_8H_{18}).

Using these data,

$$1.00\ \cancel{\text{L}\ {}_8\text{CH}_{18}} \times \frac{1000\ \cancel{\text{mL}\ {}_8\text{CH}_{18}}}{1\ \cancel{\text{L}\ {}_8\text{CH}_{18}}} \times \frac{0.692\ \cancel{\text{g}\ \text{C}_8\text{H}_{18}}}{1\ \cancel{\text{mL}\ {}_8\text{CH}_{18}}} \times \frac{1\ \cancel{\text{mol}\ {}_8\text{CH}_{18}}}{114\ \cancel{\text{g}\ \text{C}_8\text{H}_{18}}} \times \frac{-5460\ \text{kJ}}{1\ \cancel{\text{mol}\ {}_8\text{CH}_{18}}} \tag{5.4.18}$$
$$= -3.31 \times 10^4\ \text{kJ} onumber$$

The combustion of 1.00 L of isooctane produces 33,100 kJ of heat. (This amount of energy is enough to melt 99.2 kg, or about 218 lbs, of ice.)

Note: If you do this calculation one step at a time, you would find:

$$1.00\ \text{L}\ {}_8\text{CH}_{18} \longrightarrow 1.00 \times 10^3\ \text{mL}\ {}_8\text{CH}_{18}$$
$$1.00 \times 10^3\ \text{mL}\ {}_8\text{CH}_{18} \longrightarrow 692\ \text{g}\ \text{C}_8\text{H}_{18}$$
$$692\ \text{g}\ \text{C}_8\text{H}_{18} \longrightarrow 6.07\ \text{mol}\ {}_8\text{CH}_{18}$$
$$692\ \text{g}\ \text{C}_8\text{H}_{18} \longrightarrow -3.31 \times 10^4\ \text{kJ}$$

Exercise 5.4.3

How much heat is produced by the combustion of 125 g of acetylene?

Answer

6.25×10^3 kJ

Emerging Algae-Based Energy Technologies (Biofuels)

As reserves of fossil fuels diminish and become more costly to extract, the search is ongoing for replacement fuel sources for the future. Among the most promising biofuels are those derived from algae (Figure 5.4.4). The species of algae used are nontoxic, biodegradable, and among the world's fastest growing organisms. About 50% of algal weight is oil, which can be readily converted into fuel such as biodiesel. Algae can yield 26,000 gallons of biofuel per hectare—much more energy per acre than other crops. Some strains of algae can flourish in brackish water that is not usable for growing other crops. Algae can produce biodiesel, biogasoline, ethanol, butanol, methane, and even jet fuel.

Figure 5.4.4: (a) Tiny algal organisms can be (b) grown in large quantities and eventually (c) turned into a useful fuel such as biodiesel. (credit a: modification of work by Micah Sittig; credit b: modification of work by Robert Kerton; credit c: modification of work by John F. Williams)

According to the US Department of Energy, only 39,000 square kilometers (about 0.4% of the land mass of the US or less than $\frac{1}{7}$ of the area used to grow corn) can produce enough algal fuel to replace all the petroleum-based fuel used in the US. The cost of algal fuels is becoming more competitive—for instance, the US Air Force is producing jet fuel from algae at a total cost of under $5 per gallon. The process used to produce algal fuel is as follows: grow the algae (which use sunlight as their energy source and CO_2 as a raw material); harvest the algae; extract the fuel compounds (or precursor compounds); process as necessary (e.g., perform a transesterification reaction to make biodiesel); purify; and distribute (Figure 5.4.5).

Figure 5.4.5: Algae convert sunlight and carbon dioxide into oil that is harvested, extracted, purified, and transformed into a variety of renewable fuels.

Standard Enthalpy of Formation

A standard enthalpy of formation ΔH_f° is an enthalpy change for a reaction in which exactly 1 mole of a pure substance is formed from free elements in their most stable states under standard state conditions. These values are especially useful for computing or predicting enthalpy changes for chemical reactions that are impractical or dangerous to carry out, or for processes for which it is difficult to make measurements. If we have values for the appropriate standard enthalpies of formation, we can determine the enthalpy change for any reaction, which we will practice in the next section on Hess's law.

The standard enthalpy of formation of $CO_2(g)$ is −393.5 kJ/mol. This is the enthalpy change for the exothermic reaction:

$$\mathrm{C}(s) + \mathrm{O_2}(g) \longrightarrow \mathrm{CO_2}(g) \quad \Delta H_f^\circ = \Delta H_{298}^\circ = -393.5\ k\mathrm{J} \tag{5.4.19}$$

starting with the reactants at a pressure of 1 atm and 25 °C (with the carbon present as graphite, the most stable form of carbon under these conditions) and ending with one mole of CO_2, also at 1 atm and 25 °C. For nitrogen dioxide, $\mathrm{NO_{2(g)}}$, ΔH_f° is 33.2 kJ/mol. This is the enthalpy change for the reaction:

$$\frac{1}{2}\mathrm{N_2}(g) + \mathrm{O_2}(g) \longrightarrow \mathrm{NO_2}(g) \quad \Delta H_f^\circ = \Delta H_{298}^\circ = +33.2\ k\mathrm{J} \tag{5.4.20}$$

A reaction equation with $\frac{1}{2}$ mole of N_2 and 1 mole of O_2 is correct in this case because the standard enthalpy of formation always refers to 1 mole of product, $NO_2(g)$.

You will find a table of standard enthalpies of formation of many common substances in Tables T1 and T2. These values indicate that formation reactions range from highly exothermic (such as −2984 kJ/mol for the formation of P_4O_{10}) to strongly endothermic (such as +226.7 kJ/mol for the formation of acetylene, C_2H_2). By definition, the standard enthalpy of formation of an element in its most stable form is equal to zero under standard conditions, which is 1 atm for gases and 1 M for solutions.

Example 5.4.4: Evaluating an Enthalpy of Formation

Ozone, $O_3(g)$, forms from oxygen, $O_2(g)$, by an endothermic process. Ultraviolet radiation is the source of the energy that drives this reaction in the upper atmosphere. Assuming that both the reactants and products of the reaction are in their standard states, determine the standard enthalpy of formation, ΔH_f° of ozone from the following information:

$$3\,\mathrm{O_2}(g) \longrightarrow 2\,\mathrm{O_3}(g) \quad \Delta H_{298}^\circ = +286\ k\mathrm{J} onumber \tag{5.4.21}$$

Solution ΔH_f° is the enthalpy change for the formation of one mole of a substance in its standard state from the elements in their standard states. Thus, ΔH_f° for $O_3(g)$ is the enthalpy change for the reaction:

$$\frac{3}{2}\mathrm{O_2}(g) \longrightarrow \mathrm{O_3}(g) onumber \tag{5.4.22}$$

For the formation of 2 mol of $O_3(g)$, $\Delta H_{298}^\circ = +286\ k\mathrm{J}$. This ratio, $\left(\frac{286\ \mathrm{kJ}}{2\ \mathrm{mol\ O_3}}\right)$, can be used as a conversion factor to find the heat produced when 1 mole of $O_3(g)$ is formed, which is the enthalpy of formation for $O_3(g)$:

$$\Delta H^\circ \text{ for 1 mole of } \mathrm{O_3}(g) = 1\ \cancel{\mathrm{mol\ O_3}} \times \frac{286\ \mathrm{kJ}}{2\ \cancel{\mathrm{mol\ O_3}}} = 143\ \mathrm{kJ} onumber \tag{5.4.23}$$

Therefore, $\Delta H_f^\circ[O_3(g)] = +143\ \ kJ/mol$.

Exercise 5.4.4

Hydrogen gas, H_2, reacts explosively with gaseous chlorine, Cl_2, to form hydrogen chloride, $HCl(g)$. What is the enthalpy change for the reaction of 1 mole of $H_2(g)$ with 1 mole of $Cl_2(g)$ if both the reactants and products are at standard state conditions? The standard enthalpy of formation of $HCl(g)$ is −92.3 kJ/mol.

Answer

For the reaction

$$H_2(g) + Cl_2(g) \longrightarrow 2\,HCl(g) \quad \Delta H^\circ_{298} = -184.6\ kJ onumber \tag{5.4.24}$$

Example 5.4.5: Writing Reaction Equations for ΔH_f°

Write the heat of formation reaction equations for:

a. $C_2H_5OH_{(l)}$
b. $Ca_3(PO_4)_{2(s)}$

Solution

Remembering that ΔH_f° reaction equations are for forming 1 mole of the compound from its constituent elements under standard conditions, we have:

a. $2\,C(s,\ \text{graphite}) + 3\,H_2(g) + \frac{1}{2}O_2(g) \longrightarrow C_2H_5OH(l)$
b. $3\,Ca(s) + \frac{1}{2}P_4(s) + 4\,O_2(g) \longrightarrow Ca_3(PO_4)_2(s)$

Note: The standard state of carbon is graphite, and phosphorus exists as P_4.

Exercise 5.4.5

Write the heat of formation reaction equations for:

a. $C_2H_5OC_2H_{5(l)}$
b. $Na_2CO_{3(s)}$

Answer a

$4\,C(s,\ \text{graphite}) + 5\,H_2(g) + \frac{1}{2}O_2(g) \longrightarrow C_2H_5OC_2H_5(l)$;

Answer b

$$2\,Na(s) + C(s,\ \text{graphite}) + \frac{3}{2}O_2(g) \longrightarrow Na_2CO_3(s)$$

Hess's Law

There are two ways to determine the amount of heat involved in a chemical change: measure it experimentally, or calculate it from other experimentally determined enthalpy changes. Some reactions are difficult, if not impossible, to investigate and make accurate measurements for experimentally. And even when a reaction is not hard to perform or measure, it is convenient to be able to determine the heat involved in a reaction without having to perform an experiment.

This type of calculation usually involves the use of Hess's law, which states: If a process can be written as the sum of several stepwise processes, the enthalpy change of the total process equals the sum of the enthalpy changes of the various steps. Hess's law is valid because enthalpy is a state function: Enthalpy changes depend only on where a chemical process starts and ends, but not on the path it takes from start to finish. For example, we can think of the reaction of carbon with oxygen to form carbon dioxide as occurring either directly or by a two-step process. The direct process is written:

$$C_{(s)} + O_{2(g)} \longrightarrow CO_{2(g)} \quad \Delta H^\circ_{298} = -394\ kJ \tag{5.4.25}$$

In the two-step process, first carbon monoxide is formed:

$$\mathrm{C}_{(s)} + \frac{1}{2}\mathrm{O}_{2(g)} \longrightarrow \mathrm{CO}_{(g)} \quad \Delta H^\circ_{298} = -111\ \mathrm{kJ} \tag{5.4.26}$$

Then, carbon monoxide reacts further to form carbon dioxide:

$$\mathrm{CO}(g) + \frac{1}{2}\mathrm{O}_2(g) \longrightarrow \mathrm{CO}_2(g) \quad \Delta H^\circ_{298} = -283\ \mathrm{kJ} \tag{5.4.27}$$

The equation describing the overall reaction is the sum of these two chemical changes:

$$\begin{aligned}
&\text{Step 1: } \mathrm{C}(s) + \frac{1}{2}\mathrm{O}_2(g) \longrightarrow \mathrm{CO}(g)\\
&\text{Step 2: } \mathrm{CO}(g) + \frac{1}{2}\mathrm{O}_2(g) \longrightarrow \mathrm{CO}_2(g)\\
&\text{Sum: } \mathrm{C}(s) + \frac{1}{2}\mathrm{O}_2(g) + \mathrm{CO}(g) + \frac{1}{2}\mathrm{O}_2(g) \longrightarrow \mathrm{CO}(g) + \mathrm{CO}_2(g)
\end{aligned}$$

Because the CO produced in Step 1 is consumed in Step 2, the net change is:

$$\mathrm{C}_{(s)} + \mathrm{O}_{2(g)} \longrightarrow \mathrm{CO}_{2(g)} \tag{5.4.28}$$

According to Hess's law, the enthalpy change of the reaction will equal the sum of the enthalpy changes of the steps. We can apply the data from the experimental enthalpies of combustion in Table 5.4.1 to find the enthalpy change of the entire reaction from its two steps:

$$\begin{aligned}
&\mathrm{C}(s) + \frac{1}{2}\mathrm{O}_2(g) \longrightarrow \mathrm{CO}(g) && \Delta H^\circ_{298} = -111\ \mathrm{kJ}\\
&\mathrm{CO}(g) + \frac{1}{2}\mathrm{O}_2(g) \longrightarrow \mathrm{CO}_2(g) && \Delta H^\circ_{298} = -283\ \mathrm{kJ}\\
&\overline{\mathrm{C}(s) + \mathrm{O}_2(g) \longrightarrow \mathrm{CO}_2(g)} && \overline{\Delta H^\circ_{298} = -394\ \mathrm{kJ}}
\end{aligned}$$

The result is shown in Figure 5.4.6. We see that ΔH of the overall reaction is the same whether it occurs in one step or two. This finding (overall ΔH for the reaction = sum of Δ*H* values for reaction "steps" in the overall reaction) is true in general for chemical and physical processes.

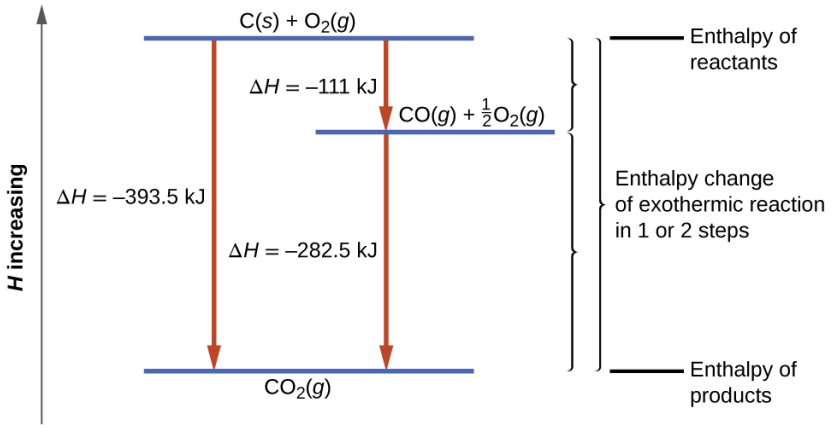

Figure 5.4.6: The formation of CO_2(g) from its elements can be thought of as occurring in two steps, which sum to the overall reaction, as described by Hess's law. The horizontal blue lines represent enthalpies. For an exothermic process, the products are at lower enthalpy than are the reactants.

Before we further practice using Hess's law, let us recall two important features of Δ*H*.

1. Δ*H* is directly proportional to the quantities of reactants or products. For example, the enthalpy change for the reaction forming 1 mole of $NO_2(g)$ is +33.2 kJ:

$$\frac{1}{2}\mathrm{N}_2(g) + \mathrm{O}_2(g) \longrightarrow \mathrm{NO}_2(g) \quad \Delta H = +33.2\ \mathrm{kJ} \tag{5.4.29}$$

When 2 moles of NO_2 (twice as much) are formed, the ΔH will be twice as large:

$$N_2(g)+2\,O_2(g) \longrightarrow 2\,NO_2(g) \quad \Delta H = +66.4\,kJ \tag{5.4.30}$$

In general, if we multiply or divide an equation by a number, then the enthalpy change should also be multiplied or divided by the same number.

2. ΔH for a reaction in one direction is equal in magnitude and opposite in sign to ΔH for the reaction in the reverse direction. For example, given that:

$$H_2(g) + Cl_2(g) \longrightarrow 2\,HCl(g) \quad \Delta H = -184.6\,kJ \tag{5.4.31}$$

Then, for the "reverse" reaction, the enthalpy change is also "reversed":

$$2\,HCl(g) \longrightarrow H_2(g) + Cl_2(g) \quad \Delta H = +184.6\,kJ \tag{5.4.32}$$

Example 5.4.6: Stepwise Calculation of ΔH_f°

Using Hess's Law Determine the enthalpy of formation, ΔH_f°, of $FeCl_3$(s) from the enthalpy changes of the following two-step process that occurs under standard state conditions:

$$Fe(s) + Cl_2(g) \longrightarrow FeCl_2(s) \quad \Delta H^\circ = -341.8\,kJ onumber \tag{5.4.33}$$

$$FeCl_2(s) + \frac{1}{2}Cl_2(g) \longrightarrow FeCl_3(s) \quad \Delta H^\circ = onumber -57.7\,kJ \tag{5.4.34}$$

Solution

We are trying to find the standard enthalpy of formation of FeCl3(s), which is equal to ΔH° for the reaction:

$$Fe(s) + \frac{3}{2}Cl_2(g) \longrightarrow FeCl_3(s) \quad \Delta H_f^\circ = ?onumber \tag{5.4.35}$$

Looking at the reactions, we see that the reaction for which we want to find ΔH° is the sum of the two reactions with known ΔH values, so we must sum their ΔHs:

$$\begin{aligned} Fe(s) + Cl_2(g) &\longrightarrow FeCl_2(s) \quad \Delta H^\circ = -341.8\,kJ \\ FeCl_2(s) + \frac{1}{2}Cl_2(g) &\longrightarrow FeCl_3(s) \quad \Delta H^\circ = -57.7\,kJ \\ \hline Fe(s) + \frac{1}{2}Cl_2(g) &\longrightarrow FeCl_3(s) \quad \Delta H^\circ = -399.5\,kJ onumber \end{aligned} \tag{5.4.36}$$

The enthalpy of formation, ΔH_f°, of $FeCl_3$(s) is −399.5 kJ/mol.

Exercise 5.4.6

Calculate ΔH for the process:

$$N_2(g)+2\,O_2(g) \longrightarrow 2\,NO_2(g) onumber \tag{5.4.37}$$

from the following information:

$$N_2(g) + O_2(g) \longrightarrow 2\,NO(g) \quad \Delta H = 180.5\,kJ onumber \tag{5.4.38}$$

$$NO(g) + \frac{1}{2}O_2(g) \longrightarrow NO_2(g) \quad \Delta H = -57.06\,kJ onumber \tag{5.4.39}$$

Answer

66.4 kJ

Here is a less straightforward example that illustrates the thought process involved in solving many Hess's law problems. It shows how we can find many standard enthalpies of formation (and other values of ΔH) if they are difficult to determine experimentally.

Example 5.4.7: A More Challenging Problem

Using Hess's Law Chlorine monofluoride can react with fluorine to form chlorine trifluoride:

$$\text{(i) } \mathrm{ClF}(g) + \mathrm{F_2}(g) \longrightarrow \mathrm{ClF_3}(g) \quad \Delta H° = \text{?}$$

Use the reactions here to determine the ΔH° for reaction (i):

$$\text{(ii) } 2\,\mathrm{OF_2}(g) \longrightarrow \mathrm{O_2}(g) + 2\,\mathrm{F_2}(g) \quad \Delta H°_{(ii)} = -49.4\ \mathrm{kJ}$$

$$\text{(iii) } 2\,\mathrm{ClF}(g) + \mathrm{O_2}(g) \longrightarrow \mathrm{Cl_2O}(g) + \mathrm{OF_2}(g) \quad \Delta H°_{(iii)} = +205.6\ \mathrm{kJ}$$

$$\text{(iv) } \mathrm{ClF_3}(g) + \mathrm{O_2}(g) \longrightarrow \tfrac{1}{2}\mathrm{Cl_2O}(g) + \frac{3}{2}\mathrm{OF_2}(g) \quad \Delta H°_{(iv)} = +266.7\ \mathrm{kJ}$$

Solution

Our goal is to manipulate and combine reactions (ii), (iii), and (iv) such that they add up to reaction (i). Going from left to right in (i), we first see that $\mathrm{ClF}_{(g)}$ is needed as a reactant. This can be obtained by multiplying reaction (iii) by $\frac{1}{2}$, which means that the ΔH° change is also multiplied by $\frac{1}{2}$:

$$\mathrm{ClF}(g) + \frac{1}{2}\mathrm{O_2}(g) \longrightarrow \frac{1}{2}\mathrm{Cl_2O}(g) + \frac{1}{2}\mathrm{OF_2}(g) \quad \Delta H°_{(iii)} = \frac{1}{2}(205.6) = +102.8\ \mathrm{kJ} \tag{5.4.40}$$

Next, we see that $\mathrm{F_2}$ is also needed as a reactant. To get this, reverse and halve reaction (ii), which means that the ΔH° changes sign and is halved:

$$\frac{1}{2}\mathrm{O_2}(g) + \mathrm{F_2}(g) \longrightarrow \mathrm{OF_2}(g) \quad \Delta H° = +24.7\ \mathrm{kJ} \tag{5.4.41}$$

To get $\mathrm{ClF_3}$ as a product, reverse (iv), changing the sign of ΔH°:

$$\frac{1}{2}\mathrm{Cl_2O}(g) + \frac{3}{2}\mathrm{OF_2}(g) \longrightarrow \mathrm{ClF_3}(g) + \mathrm{O_2}(g) \quad \Delta H° = -266.7\ \mathrm{kJ} \tag{5.4.42}$$

Now check to make sure that these reactions add up to the reaction we want:

$$\begin{array}{ll}
\mathrm{ClF}(g) + \frac{1}{2}\mathrm{O_2}(g) \longrightarrow \frac{1}{2}\mathrm{Cl_2O}(g) + \frac{1}{2}\mathrm{OF_2}(g) & \Delta H° = +102.8\ \mathrm{kJ} \\
\frac{1}{2}\mathrm{O_2}(g) + \mathrm{F_2}(g) \longrightarrow \mathrm{OF_2}(g) & \Delta H° = +24.7\ \mathrm{kJ} \\
\frac{1}{2}\mathrm{Cl_2O}(g) + \frac{3}{2}\mathrm{OF_2}(g) \longrightarrow \mathrm{ClF_3}(g) + \mathrm{O_2}(g) & \Delta H° = -266.7\ \mathrm{kJ} \\
\hline
\mathrm{ClF}(g) + \mathrm{F_2} \longrightarrow \mathrm{ClF_3}(g) & \Delta H° = -139.2\ \mathrm{kJ}
\end{array}$$

Reactants $\frac{1}{2}\mathrm{O_2}$ and $\frac{1}{2}\mathrm{O_2}$ cancel out product O_2; product $\frac{1}{2}\mathrm{Cl_2O}$ cancels reactant $\frac{1}{2}\mathrm{Cl_2O}$; and reactant $\frac{3}{2}\mathrm{OF_2}$ is cancelled by products $\frac{1}{2}\mathrm{OF_2}$ and OF_2. This leaves only reactants ClF(g) and F_2(g) and product ClF_3(g), which are what we want. Since summing these three modified reactions yields the reaction of interest, summing the three modified ΔH° values will give the desired ΔH°:

$$\Delta H° = (+102.8\ \mathrm{kJ}) + (24.7\ \mathrm{kJ}) + (-266.7\ \mathrm{kJ}) = -139.2\ \mathrm{kJ}$$

Exercise 5.4.7

Aluminum chloride can be formed from its elements:

$$\text{(i) } 2\,\mathrm{Al}(s) + 3\,\mathrm{Cl_2}(g) \longrightarrow 2\,\mathrm{AlCl_3}(s) \quad \Delta H° = \text{?}$$

Use the reactions here to determine the ΔH° for reaction (i):

$$\text{(ii) } \mathrm{HCl}(g) \longrightarrow \mathrm{HCl}(aq) \quad \Delta H°_{(ii)} = -74.8\ \mathrm{kJ}$$

$$\text{(iii) } \mathrm{H_2}(g) + \mathrm{Cl_2}(g) \longrightarrow 2\,\mathrm{HCl}(g) \quad \Delta H°_{(iii)} = -185\ \mathrm{kJ}$$

$$\text{(iv) } \mathrm{AlCl_3}(aq) \longrightarrow \mathrm{AlCl_3}(s) \quad \Delta H°_{(iv)} = +323\ \mathrm{kJ/mol}$$

$$\text{(v) } 2\,\mathrm{Al}(s) + 6\,\mathrm{HCl}(aq) \longrightarrow 2\,\mathrm{AlCl_3}(aq) + 3\,\mathrm{H_2}(g) \quad \Delta H°_{(v)} = -1049\ \mathrm{kJ}$$

Answer

−1407 kJ

We also can use Hess's law to determine the enthalpy change of any reaction if the corresponding enthalpies of formation of the reactants and products are available. The stepwise reactions we consider are: (i) decompositions of the reactants into their component elements (for which the enthalpy changes are proportional to the negative of the enthalpies of formation of the reactants), followed by (ii) re-combinations of the elements to give the products (with the enthalpy changes proportional to the enthalpies of formation of the products). The standard enthalpy change of the overall reaction is therefore equal to: (ii) the sum of the standard enthalpies of formation of all the products plus (i) the sum of the negatives of the standard enthalpies of formation of the reactants. This is usually rearranged slightly to be written as follows, with $\sum$ representing "the sum of" and n standing for the stoichiometric coefficients:

$$\Delta H^\circ_{\text{reaction}} = \sum n \times \Delta H^\circ_f(\text{products}) - \sum n \times \Delta H^\circ_f(\text{reactants}) \tag{5.4.43}$$

The following example shows in detail why this equation is valid, and how to use it to calculate the enthalpy change for a reaction of interest.

Example 5.4.8: Using Hess's Law

What is the standard enthalpy change for the reaction:

$$3\,NO_2(g) + H_2O(l) \longrightarrow 2\,HNO_3(aq) + NO(g) \quad \Delta H° = ?onumber \tag{5.4.44}$$

Solution 1: Using the Equation

Alternatively, we could use the special form of Hess's law given previously:

$$\Delta H^\circ_{\text{reaction}} = \sum n \times \Delta H^\circ_f(\text{products}) - \sum n \times \Delta H^\circ_f(\text{reactants})onumber \tag{5.4.45}$$

$$\begin{aligned}
&= \left[2\ \cancel{\text{mol HNO}_3} \times \frac{-207.4\ \text{kJ}}{\cancel{\text{mol HNO}_3\ (aq)}} + 1\ \cancel{\text{mol NO}\ (g)} \times \frac{+90.2\ \text{kJ}}{\cancel{\text{mol NO}\ (g)}}\right] \\
&- \left[3\ \cancel{\text{mol NO}_2(g)} \times \frac{+33.2\ \text{kJ}}{\cancel{\text{mol NO}_2\ (g)}} + 1\ \cancel{\text{mol H}_2\text{O}\ (l)} \times \frac{-285.8\ \text{kJ}}{\cancel{\text{mol H}_2\text{O}\ (l)}}\right] \\
&= 2(-207.4\ \text{kJ}) + 1(+90.2\ \text{kJ}) - 3(+33.2\ \text{kJ}) - 1(-285.8\ \text{kJ}) \\
&= -138.4\ \text{kJ}
\end{aligned}$$

Solution 2: Supporting Why the General Equation Is Valid

We can write this reaction as the sum of the decompositions of $3NO_2(g)$ and $1H_2O(l)$ into their constituent elements, and the formation of 2 $HNO_3(aq)$ and 1 $NO(g)$ from their constituent elements. Writing out these reactions, and noting their relationships to the ΔH°_f values for these compounds (from Tables T1 and T2), we have:

$$3\,NO_2(g) \longrightarrow \frac{3}{2}N_2(g) + 3O_2(g) \quad \Delta H^\circ_1 = -99.6\ \text{kJ}onumber \tag{5.4.46}$$

$$H_2O(l) \longrightarrow H_2(g) + \frac{1}{2}O_2(g) \quad \Delta H^\circ_2 = +285.8\ kJ\ [-1 \times \Delta H^\circ_f(H_2O)]onumber \tag{5.4.47}$$

$$\begin{aligned}
H_2(g) + N_2(g) + 3O_2(g) \longrightarrow 2\,HNO_3(aq) \quad \Delta H^\circ_3 \\
= -414.8\ kJ\ [2 \times \Delta H^\circ_f(HNO_3\ \text{onumber})]
\end{aligned} \tag{5.4.48}$$

$$\frac{1}{2}N_2(g) + \frac{1}{2}O_2(g) \longrightarrow NO(g) \quad \Delta H°onumber_4 = +90.2\ kJ\ [1 \times (NO)] \tag{5.4.49}$$

Summing these reaction equations gives the reaction we are interested in:

$$3\,NO_2(g) + H_2O(l) \longrightarrow 2\,HNO_3(aq) + NO(g)onumber \tag{5.4.50}$$

Summing their enthalpy changes gives the value we want to determine:

$$\begin{aligned}
\Delta H^\circ_{\text{rxn}} &= \Delta H^\circ_1 + \Delta H^\circ_2 + \Delta H^\circ_3 + \Delta H^\circ_4 = (-99.6\ \text{kJ}) + (+285.8\ \text{kJ}) + (-414.8\ \text{kJ}) + (+90.2\ \text{kJ}) \\
&= -138.4\ \text{kJ}
\end{aligned}$$

So the standard enthalpy change for this reaction is $\Delta H° = -138.4$ kJ.

Note that this result was obtained by:

1. multiplying the ΔH_f° of each product by its stoichiometric coefficient and summing those values,
2. multiplying the ΔH_f° of each reactant by its stoichiometric coefficient and summing those values, and then
3. subtracting the result found in step 2 from the result found in step 1.

This is also the procedure in using the general equation, as shown.

Exercise 5.4.8

Calculate the heat of combustion of 1 mole of ethanol, $C_2H_5OH(l)$, when $H_2O(l)$ and $CO_2(g)$ are formed. Use the following enthalpies of formation: $C_2H_5OH(l)$, −278 kJ/mol; $H_2O(l)$, −286 kJ/mol; and $CO_2(g)$, −394 kJ/mol.

Answer

−1368 kJ/mol

Summary

If a chemical change is carried out at constant pressure and the only work done is caused by expansion or contraction, q for the change is called the enthalpy change with the symbol ΔH, or ΔH_{298}° for reactions occurring under standard state conditions. The value of ΔH for a reaction in one direction is equal in magnitude, but opposite in sign, to ΔH for the reaction in the opposite direction, and ΔH is directly proportional to the quantity of reactants and products. Examples of enthalpy changes include enthalpy of combustion, enthalpy of fusion, enthalpy of vaporization, and standard enthalpy of formation. The standard enthalpy of formation, ΔH_f°, is the enthalpy change accompanying the formation of 1 mole of a substance from the elements in their most stable states at 1 bar (standard state). Many of the processes are carried out at 298.15 K. If the enthalpies of formation are available for the reactants and products of a reaction, the enthalpy change can be calculated using Hess's law: If a process can be written as the sum of several stepwise processes, the enthalpy change of the total process equals the sum of the enthalpy changes of the various steps.

Key Equations

- $\Delta U = q + w$
- $\Delta H_{\text{reaction}}^\circ = \sum n \times \Delta H_f^\circ(\text{products}) - \sum n \times \Delta H_f^\circ(\text{reactants})$

Footnotes

1. 1 For more on algal fuel, see http://www.theguardian.com/environme...n-fuel-problem.

Glossary

chemical thermodynamics

area of science that deals with the relationships between heat, work, and all forms of energy associated with chemical and physical processes

enthalpy (H)

sum of a system's internal energy and the mathematical product of its pressure and volume

enthalpy change (ΔH)

heat released or absorbed by a system under constant pressure during a chemical or physical process

expansion work (pressure-volume work)

work done as a system expands or contracts against external pressure

first law of thermodynamics

internal energy of a system changes due to heat flow in or out of the system or work done on or by the system

Hess's law

if a process can be represented as the sum of several steps, the enthalpy change of the process equals the sum of the enthalpy changes of the steps

hydrocarbon

compound composed only of hydrogen and carbon; the major component of fossil fuels

internal energy (*U*)

total of all possible kinds of energy present in a substance or substances

standard enthalpy of combustion (ΔH_c°)

heat released when one mole of a compound undergoes complete combustion under standard conditions

standard enthalpy of formation (ΔH_f°)

enthalpy change of a chemical reaction in which 1 mole of a pure substance is formed from its elements in their most stable states under standard state conditions

standard state

set of physical conditions as accepted as common reference conditions for reporting thermodynamic properties; 1 bar of pressure, and solutions at 1 molar concentrations, usually at a temperature of 298.15 K

state function

property depending only on the state of a system, and not the path taken to reach that state

Contributors

- Paul Flowers (University of North Carolina - Pembroke), Klaus Theopold (University of Delaware) and Richard Langley (Stephen F. Austin State University) with contributing authors. Textbook content produced by OpenStax College is licensed under a Creative Commons Attribution License 4.0 license. Download for free at http://cnx.org/contents/85abf193-2bd...a7ac8df6@9.110).

This page titled 5.4: Enthalpy is shared under a CC BY license and was authored, remixed, and/or curated by OpenStax.

CHAPTER OVERVIEW

6: Electronic Structure and Periodic Properties

A general chemistry Libretexts Textbook remixed and remastered from OpenStax's textbook:

General Chemistry

The study of chemistry must at some point extend to the molecular level, for the physical and chemical properties of a substance are ultimately explained in terms of the structure and bonding of molecules. This module introduces some basic facts and principles that are needed for a discussion of organic molecules.

6.1: The Bohr Model

6.2: Development of Quantum Theory

6.3: Electronic Structure of Atoms (Electron Configurations)

6.4: Periodic Variations in Element Properties

Contributors

- Paul Flowers (University of North Carolina - Pembroke), Klaus Theopold (University of Delaware) and Richard Langley (Stephen F. Austin State University) with contributing authors. Textbook content produced by OpenStax College is licensed under a Creative Commons Attribution License 4.0 license. Download for free at http://cnx.org/contents/85abf193-2bd...a7ac8df6@9.110).

This page titled 6: Electronic Structure and Periodic Properties is shared under a CC BY license and was authored, remixed, and/or curated by OpenStax.

6.1: The Bohr Model

Skills to Develop

- Describe the Bohr model of the hydrogen atom
- Use the Rydberg equation to calculate energies of light emitted or absorbed by hydrogen atoms

We can relate the energy of electrons in atoms to what we learned previously about energy. The law of conservation of energy says that we can neither create nor destroy energy. Thus, if a certain amount of external energy is required to excite an electron from one energy level to another, that same amount of energy will be liberated when the electron returns to its initial state (Figure **6.1.2**). In effect, an atom can "store" energy by using it to promote an electron to a state with a higher energy and release it when the electron returns to a lower state. The energy can be released as one quantum of energy, as the electron returns to its ground state (say, from $n = 5$ to $n = 1$), or it can be released as two or more smaller quanta as the electron falls to an intermediate state, then to the ground state (say, from $n = 5$ to $n = 4$, emitting one quantum, then to $n = 1$, emitting a second quantum).

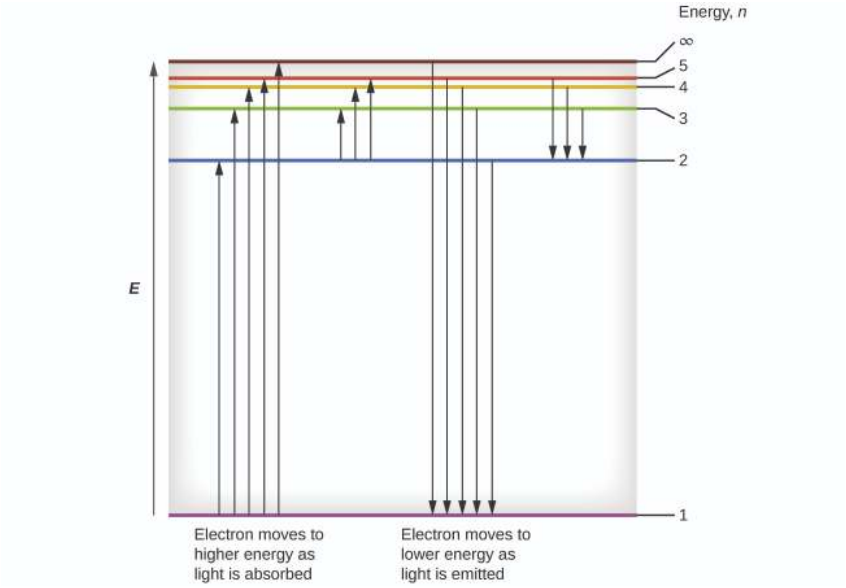

Figure **6.1.2**: The horizontal lines show the relative energy of orbits in the Bohr model of the hydrogen atom, and the vertical arrows depict the energy of photons absorbed (left) or emitted (right) as electrons move between these orbits.

Since Bohr's model involved only a single electron, it could also be applied to the single electron ions He^{+}, Li^{2+}, Be^{3+}, and so forth, which differ from hydrogen only in their nuclear charges, and so one-electron atoms and ions are collectively referred to as *hydrogen-like* or *hydrogenic* atoms.

Bohr's model of the hydrogen atom provides insight into the behavior of matter at the microscopic level, but it is does not account for electron–electron interactions in atoms with more than one electron. It does introduce several important features of all models used to describe the distribution of electrons in an atom. These features include the following:

- The energies of electrons (energy levels) in an atom are quantized, described by quantum numbers: integer numbers having only specific allowed value and used to characterize the arrangement of electrons in an atom.
- An electron's energy increases with increasing distance from the nucleus.
- The discrete energies (lines) in the spectra of the elements result from quantized electronic energies.

Of these features, the most important is the postulate of quantized energy levels for an electron in an atom. As a consequence, the model laid the foundation for the quantum mechanical model of the atom. Bohr won a Nobel Prize in Physics for his contributions to our understanding of the structure of atoms and how that is related to line spectra emissions.

Summary

Bohr incorporated Planck's and Einstein's quantization ideas into a model of the hydrogen atom that resolved the paradox of atom stability and discrete spectra. The Bohr model of the hydrogen atom explains the connection between the quantization of photons

and the quantized emission from atoms. Bohr described the hydrogen atom in terms of an electron moving in a circular orbit about a nucleus. He postulated that the electron was restricted to certain orbits characterized by discrete energies. Transitions between these allowed orbits result in the absorption or emission of photons. When an electron moves from a higher-energy orbit to a more stable one, energy is emitted in the form of a photon. To move an electron from a stable orbit to a more excited one, a photon of energy must be absorbed. Using the Bohr model, we can calculate the energy of an electron and the radius of its orbit in any one-electron system.

Glossary

Bohr's model of the hydrogen atom
: structural model in which an electron moves around the nucleus only in circular orbits, each with a specific allowed radius; the orbiting electron does not normally emit electromagnetic radiation, but does so when changing from one orbit to another.

excited state
: state having an energy greater than the ground-state energy

ground state
: state in which the electrons in an atom, ion, or molecule have the lowest energy possible

quantum number
: integer number having only specific allowed values and used to characterize the arrangement of electrons in an atom

Contributors

- Paul Flowers (University of North Carolina - Pembroke), Klaus Theopold (University of Delaware) and Richard Langley (Stephen F. Austin State University) with contributing authors. Textbook content produced by OpenStax College is licensed under a Creative Commons Attribution License 4.0 license. Download for free at http://cnx.org/contents/85abf193-2bd...a7ac8df6@9.110).

This page titled 6.1: The Bohr Model is shared under a CC BY license and was authored, remixed, and/or curated by OpenStax.

6.2: Development of Quantum Theory

Skills to Develop

- Extend the concept of wave–particle duality that was observed in electromagnetic radiation to matter as well
- Understand the general idea of the quantum mechanical description of electrons in an atom, and that it uses the notion of three-dimensional wave functions, or orbitals, that define the distribution of probability to find an electron in a particular part of space
- List and describe traits of the four quantum numbers that form the basis for completely specifying the state of an electron in an atom

Bohr's model explained the experimental data for the hydrogen atom and was widely accepted, but it also raised many questions. Why did electrons orbit at only fixed distances defined by a single quantum number n = 1, 2, 3, and so on, but never in between? Why did the model work so well describing hydrogen and one-electron ions, but could not correctly predict the emission spectrum for helium or any larger atoms? To answer these questions, scientists needed to completely revise the way they thought about matter.

Behavior in the Microscopic World

We know how matter behaves in the macroscopic world—objects that are large enough to be seen by the naked eye follow the rules of classical physics. A billiard ball moving on a table will behave like a particle: It will continue in a straight line unless it collides with another ball or the table cushion, or is acted on by some other force (such as friction). The ball has a well-defined position and velocity (or a well-defined momentum, $p = mv$, defined by mass m and velocity v) at any given moment. In other words, the ball is moving in a classical trajectory. This is the typical behavior of a classical object.

When waves interact with each other, they show interference patterns that are not displayed by macroscopic particles such as the billiard ball. For example, interacting waves on the surface of water can produce interference patters similar to those shown on Figure **6.2.1**. This is a case of wave behavior on the macroscopic scale, and it is clear that particles and waves are very different phenomena in the macroscopic realm.



Figure **6.2.1***: An interference pattern on the water surface is formed by interacting waves. The waves are caused by reflection of water from the rocks. (credit: modification of work by Sukanto Debnath)*

As technological improvements allowed scientists to probe the microscopic world in greater detail, it became increasingly clear by the 1920s that very small pieces of matter follow a different set of rules from those we observe for large objects. The unquestionable separation of waves and particles was no longer the case for the microscopic world.

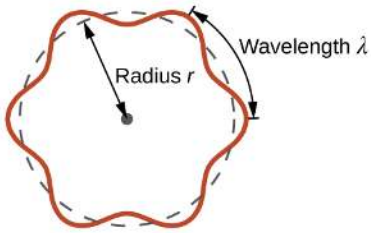

Figure **6.2.1***: If an electron is viewed as a wave circling around the nucleus, an integer number of wavelengths must fit into the orbit for this standing wave behavior to be possible.*

Understanding Quantum Theory of Electrons in Atoms

The goal of this section is to understand the electron orbitals (location of electrons in atoms), their different energies, and other properties. The use of quantum theory provides the best understanding to these topics. This knowledge is a precursor to chemical bonding.

As was described previously, electrons in atoms can exist only on discrete energy levels but not between them. It is said that the energy of an electron in an atom is quantized, that is, it can be equal only to certain specific values and can jump from one energy level to another but not transition smoothly or stay between these levels.

The energy levels are labeled with an n value, where n = 1, 2, 3, …. Generally speaking, the energy of an electron in an atom is greater for greater values of n. This number, n, is referred to as the principal quantum number. The principal quantum number defines the location of the energy level. It is essentially the same concept as the n in the Bohr atom description. Another name for the principal quantum number is the shell number. The shells of an atom can be thought of concentric circles radiating out from the nucleus. The electrons that belong to a specific shell are most likely to be found within the corresponding circular area. The further we proceed from the nucleus, the higher the shell number, and so the higher the energy level (Figure **6.2.5**). The positively charged protons in the nucleus stabilize the electronic orbitals by electrostatic attraction between the positive charges of the protons and the negative charges of the electrons. So the further away the electron is from the nucleus, the greater the energy it has.

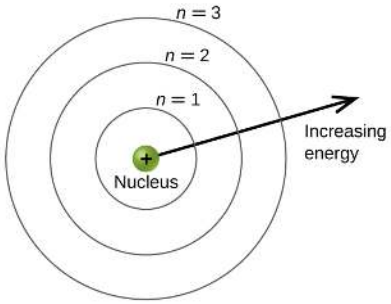

Figure **6.2.5**: *Different shells are numbered by principal quantum numbers.*

This quantum mechanical model for where electrons reside in an atom can be used to look at electronic transitions, the events when an electron moves from one energy level to another. If the transition is to a higher energy level, energy is absorbed, and the energy change has a positive value. To obtain the amount of energy necessary for the transition to a higher energy level, a photon is absorbed by the atom. A transition to a lower energy level involves a release of energy, and the energy change is negative. This process is accompanied by emission of a photon by the atom. The following equation summarizes these relationships and is based on the hydrogen atom:

$$\begin{aligned}\Delta E &= E_{\text{final}} - E_{\text{initial}} \\ &= -2.18 \times 10^{-18} \left(\frac{1}{n_{\text{f}}^2} - \frac{1}{n_{\text{i}}^2} \right) \text{ J}\end{aligned}$$

The values n_{f} and n_{i} are the final and initial energy states of the electron.

The principal quantum number is one of three quantum numbers used to characterize an orbital. An atomic orbital, which is distinct from an *orbit*, is a general region in an atom within which an electron is most probable to reside. In addition, the principal quantum number defines the energy of an electron in a hydrogen or hydrogen-like atom or an ion (an atom or an ion with only one electron) and the general region in which discrete energy levels of electrons in a multi-electron atoms and ions are located.

The *s* subshell electron density distribution is spherical and the *p* subshell has a dumbbell shape. The *d* and *f* orbitals are more complex. These shapes represent the three-dimensional regions within which the electron is likely to be found.

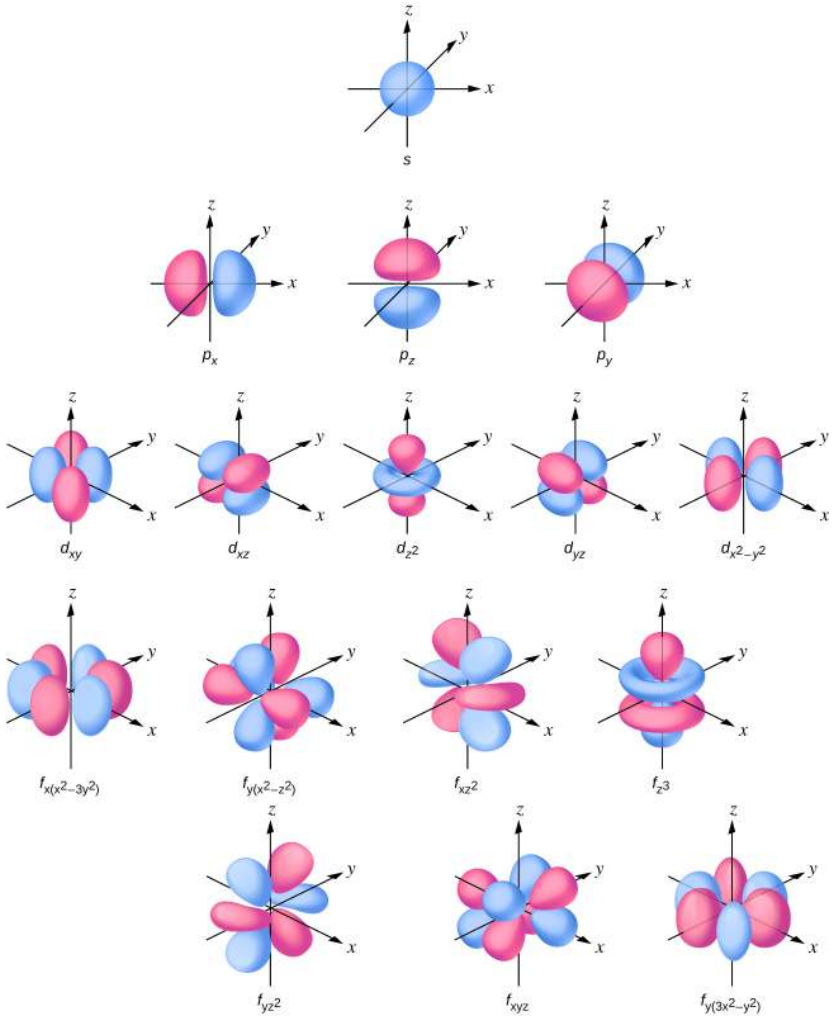

Figure **6.2.7**: *Shapes of s, p, d, and f orbitals.*

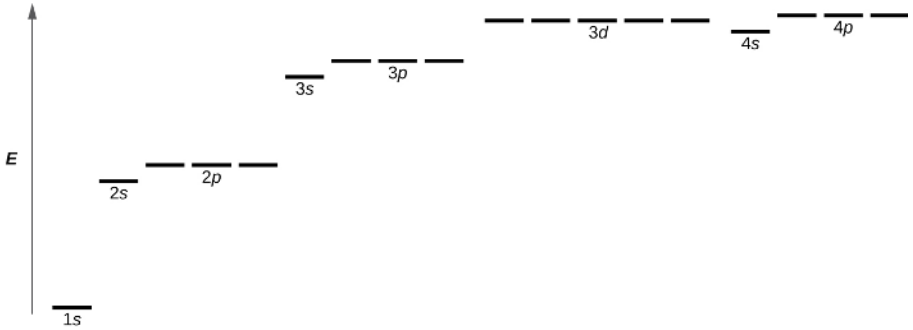

Figure **6.2.8**: *The chart shows the energies of electron orbitals in a multi-electron atom.*

https://chem.libretexts.org/@go/page/162470

Figure 6.2.8 illustrates the energy levels for various orbitals. The number before the orbital name (such as 2*s*, 3*p*, and so forth) stands for the principal quantum number, *n*. The letter in the orbital name defines the subshell. In the case of a hydrogen atom or a one-electron ion (such as He^{+}, Li^{2+}, and so on), energies of all the orbitals with the same *n* are the same. This is called a degeneracy, and the energy levels for the same principal quantum number, *n*, are called degenerate energy levels. However, in atoms with more than one electron, this degeneracy is eliminated by the electron–electron interactions, and orbitals that belong to different subshells have different energies. Orbitals within the same subshell (for example *ns*, *np*, *nd*, *nf*, such as 2*p*, 3*s*) are still degenerate and have the same energy.

The Pauli Exclusion Principle

An Austrian physicist Wolfgang Pauli formulated a general principle that gives the last piece of information that we need to understand the general behavior of electrons in atoms. The Pauli exclusion principle can be formulated as follows: No two electrons in the same atom can have exactly the same quantum number and spin the same direction. What this means is that electrons can share the same orbital, but only if their spin have different values. Spin quantum numbers can only have two values $\left(\pm\frac{1}{2}\right)$, no more than two electrons can occupy the same orbital (and if two electrons are located in the same orbital, they must have opposite spins). Therefore, any atomic orbital can be populated by only zero, one, or two electrons.

Summary

An atomic orbital is characterized by the principal quantum number, *n*, can be any positive integer. The general region for value of energy of the orbital and the average distance of an electron from the nucleus are related to *n*. Orbitals having the same value of *n* are said to be in the same shell. In addition, each electron has a spin number that can be equal to $\pm\frac{1}{2}$. No two electrons in the same atom can have the same set of values for both quantum number and spin.

Glossary

atomic orbital
: mathematical function that describes the behavior of an electron in an atom (also called the wavefunction), it can be used to find the probability of locating an electron in a specific region around the nucleus, as well as other dynamical variables

***d* orbital**
: region of space with high electron density that is either four lobed or contains a dumbbell and torus shape; describes orbitals with $l = 2$. An electron in this orbital is called a *d* electron

***f* orbital**
: multilobed region of space with high electron density, describes orbitals with $l = 3$. An electron in this orbital is called an *f* electron

***p* orbital**
: dumbbell-shaped region of space with high electron density, describes orbitals with $l = 1$. An electron in this orbital is called a *p* electron

Pauli exclusion principle
: specifies that no two electrons in an atom can have the same value for the principle quantum number **and** spin

principal quantum number (*n*)
: quantum number specifying the shell an electron occupies in an atom

quantum mechanics
: field of study that includes quantization of energy, wave-particle duality, and the Heisenberg uncertainty principle to describe matter

***s* orbital**

spherical region of space with high electron density, describes orbitals with $l = 0$. An electron in this orbital is called an *s* electron

shell

set of orbitals with the same principal quantum number, *n*

spin quantum number (m_s)

number specifying the electron spin direction, either $+\frac{1}{2}$ or $-\frac{1}{2}$

subshell

set of orbitals in an atom with the same values of *n* but opposite spin

Contributors

- Paul Flowers (University of North Carolina - Pembroke), Klaus Theopold (University of Delaware) and Richard Langley (Stephen F. Austin State University) with contributing authors. Textbook content produced by OpenStax College is licensed under a Creative Commons Attribution License 4.0 license. Download for free at http://cnx.org/contents/85abf193-2bd...a7ac8df6@9.110).

This page titled 6.2: Development of Quantum Theory is shared under a CC BY license and was authored, remixed, and/or curated by OpenStax.

6.3: Electronic Structure of Atoms (Electron Configurations)

Learning Objectives

- Derive the predicted ground-state electron configurations of atoms
- Identify and explain exceptions to predicted electron configurations for atoms and ions
- Relate electron configurations to element classifications in the periodic table

Having introduced the basics of atomic structure and quantum mechanics, we can use our understanding of quantum numbers to determine how atomic orbitals relate to one another. This allows us to determine which orbitals are occupied by electrons in each atom. The specific arrangement of electrons in orbitals of an atom determines many of the chemical properties of that atom.

Orbital Energies and Atomic Structure

The energy of atomic orbitals increases as the principal quantum number, n, increases. In any atom with two or more electrons, the repulsion between the electrons makes energies of subshells with different values of l differ so that the energy of the orbitals increases within a shell in the order $s < p < d < f$. Figure **6.3.1** depicts how these two trends in increasing energy relate. The 1*s* orbital at the bottom of the diagram is the orbital with electrons of lowest energy. The energy increases as we move up to the 2*s* and then 2*p*, 3*s*, and 3*p* orbitals, showing that the increasing *n* value has more influence on energy than the increasing *l* value for small atoms. However, this pattern does not hold for larger atoms. The 3*d* orbital is higher in energy than the 4*s* orbital. Such overlaps continue to occur frequently as we move up the chart.

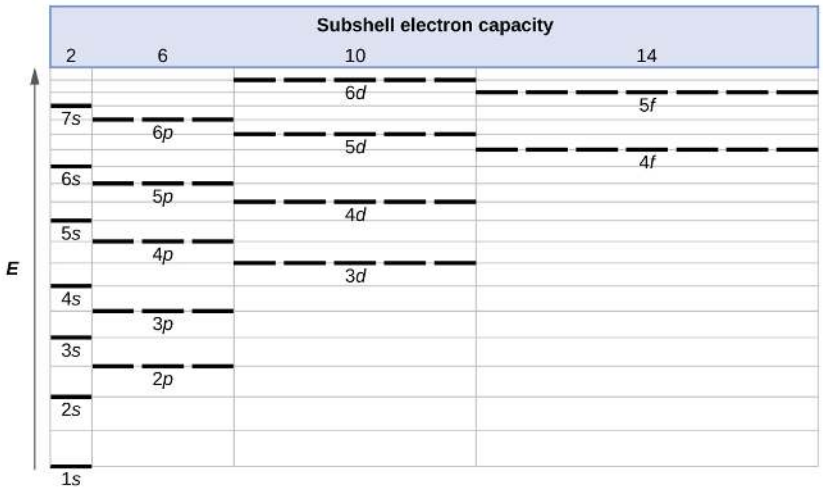

Figure **6.3.1**: Generalized energy-level diagram for atomic orbitals in an atom with two or more electrons (not to scale).

Electrons in successive atoms on the periodic table tend to fill low-energy orbitals first. Thus, many students find it confusing that, for example, the 5*p* orbitals fill immediately after the 4*d*, and immediately before the 6*s*. The filling order is based on observed experimental results, and has been confirmed by theoretical calculations. As the principal quantum number, *n*, increases, the size of the orbital increases and the electrons spend more time farther from the nucleus. Thus, the attraction to the nucleus is weaker and the energy associated with the orbital is higher (less stabilized). But this is not the only effect we have to take into account. Within each shell, as the value of *l* increases, the electrons are less penetrating (meaning there is less electron density found close to the nucleus), in the order $s > p > d > f$. Electrons that are closer to the nucleus slightly repel electrons that are farther out, offsetting the more dominant electron–nucleus attractions slightly (recall that all electrons have −1 charges, but nuclei have +*Z* charges). This phenomenon is called shielding and will be discussed in more detail in the next section. Electrons in orbitals that experience more shielding are less stabilized and thus higher in energy. For small orbitals (1*s* through 3*p*), the increase in energy due to *n* is more significant than the increase due to *l*; however, for larger orbitals the two trends are comparable and cannot be simply predicted. We will discuss methods for remembering the observed order.

The arrangement of electrons in the orbitals of an atom is called the electron configuration of the atom. We describe an electron configuration with a symbol that contains three pieces of information (Figure **6.3.2**):

1. The number of the principal quantum shell, n,
2. The letter that designates the orbital type (the subshell, l), and
3. A superscript number that designates the number of electrons in that particular subshell.

For example, the notation $2p^4$ (read "two–p–four") indicates four electrons in a p subshell (l = 1) with a principal quantum number (n) of 2. The notation $3d^8$ (read "three–d–eight") indicates eight electrons in the d subshell (i.e., l = 2) of the principal shell for which n = 3.

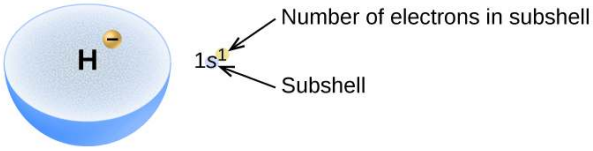

Figure **6.3.2**: The diagram of an electron configuration specifies the subshell (n and l value, with letter symbol) and superscript number of electrons.

The Aufbau Principle

To determine the electron configuration for any particular atom, we can “build” the structures in the order of atomic numbers. Beginning with hydrogen, and continuing across the periods of the periodic table, we add one proton at a time to the nucleus and one electron to the proper subshell until we have described the electron configurations of all the elements. This procedure is called the Aufbau principle, from the German word *Aufbau* (“to build up”). Each added electron occupies the subshell of lowest energy available (in the order shown in Figure **6.3.3**), subject to the limitations imposed by the allowed quantum numbers according to the Pauli exclusion principle. Electrons enter higher-energy subshells only after lower-energy subshells have been filled to capacity. Figure **6.3.3** illustrates the traditional way to remember the filling order for atomic orbitals.

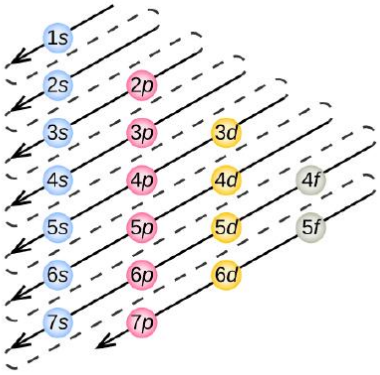

Figure **6.3.3**: The arrow leads through each subshell in the appropriate filling order for electron configurations. This chart is straightforward to construct. Simply make a column for all the s orbitals with each n shell on a separate row. Repeat for p, d, and f. Be sure to only include orbitals allowed by the quantum numbers (no 1p or 2d, and so forth). Finally, draw diagonal lines from top to bottom as shown.

Since the arrangement of the periodic table is based on the electron configurations, Figure **6.3.4** provides an alternative method for determining the electron configuration. The filling order simply begins at hydrogen and includes each subshell as you proceed in increasing Z order. For example, after filling the 3p block up to Ar, we see the orbital will be 4s (K, Ca), followed by the 3d orbitals.

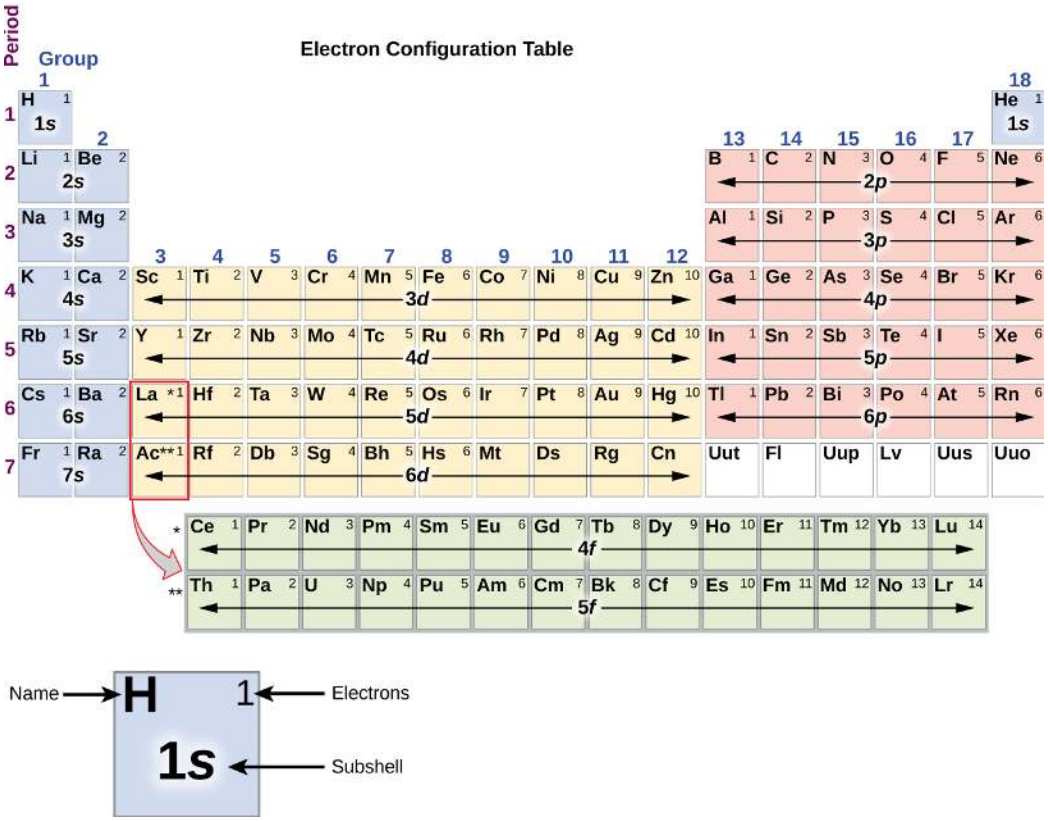

Figure 6.3.4: This periodic table shows the electron configuration for each subshell. By "building up" from hydrogen, this table can be used to determine the electron configuration for any atom on the periodic table.

We will now construct the ground-state electron configuration and orbital diagram for a selection of atoms in the first and second periods of the periodic table. Orbital diagrams are pictorial representations of the electron configuration, showing the individual orbitals and the pairing arrangement of electrons. We start with a single hydrogen atom (atomic number 1), which consists of one proton and one electron. Referring to either Figure 6.3.3 or 6.3.4, we would expect to find the electron in the 1*s* orbital. By convention, the $m_s = +\frac{1}{2}$ value is usually filled first. The electron configuration and the orbital diagram are:

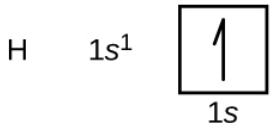

Following hydrogen is the noble gas helium, which has an atomic number of 2. The helium atom contains two protons and two electrons. The first electron has the same four quantum numbers as the hydrogen atom electron (n = 1, l = 0, m_l = 0, $m_s = +\frac{1}{2}$). The second electron also goes into the 1*s* orbital and fills that orbital. The second electron has the same n, l, and m_l quantum numbers, but must have the opposite spin quantum number, $m_s = -\frac{1}{2}$. This is in accord with the Pauli exclusion principle: No two electrons in the same atom can have the same set of four quantum numbers. For orbital diagrams, this means two arrows go in each box (representing two electrons in each orbital) and the arrows must point in opposite directions (representing paired spins). The electron configuration and orbital diagram of helium are:

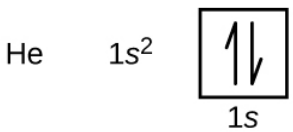

The n = 1 shell is completely filled in a helium atom.

The next atom is the alkali metal lithium with an atomic number of 3. The first two electrons in lithium fill the 1*s* orbital and have the same sets of four quantum numbers as the two electrons in helium. The remaining electron must occupy the orbital of next lowest energy, the 2*s* orbital (Figure **6.3.3** or **6.3.4**). Thus, the electron configuration and orbital diagram of lithium are:

Li $1s^2 2s^1$

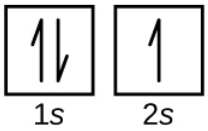

An atom of the alkaline earth metal beryllium, with an atomic number of 4, contains four protons in the nucleus and four electrons surrounding the nucleus. The fourth electron fills the remaining space in the 2*s* orbital.

Be $1s^2 2s^2$

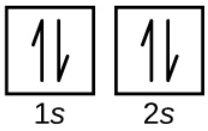

An atom of boron (atomic number 5) contains five electrons. The $n = 1$ shell is filled with two electrons and three electrons will occupy the $n = 2$ shell. Because any *s* subshell can contain only two electrons, the fifth electron must occupy the next energy level, which will be a 2*p* orbital. There are three degenerate 2*p* orbitals ($m_l = -1, 0, +1$) and the electron can occupy any one of these *p* orbitals. When drawing orbital diagrams, we include empty boxes to depict any empty orbitals in the same subshell that we are filling.

B $1s^2 2s^2 2p^1$

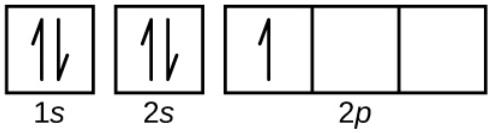

Carbon (atomic number 6) has six electrons. Four of them fill the 1*s* and 2*s* orbitals. The remaining two electrons occupy the 2*p* subshell. We now have a choice of filling one of the 2*p* orbitals and pairing the electrons or of leaving the electrons unpaired in two different, but degenerate, *p* orbitals. The orbitals are filled as described by Hund's rule: the lowest-energy configuration for an atom with electrons within a set of degenerate orbitals is that having the maximum number of unpaired electrons. Thus, the two electrons in the carbon 2*p* orbitals have identical *n*, *l*, and m_s quantum numbers and differ in their m_l quantum number (in accord with the Pauli exclusion principle). The electron configuration and orbital diagram for carbon are:

C $1s^2 2s^2 2p^2$

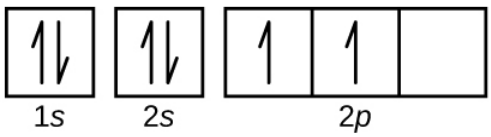

Nitrogen (atomic number 7) fills the 1*s* and 2*s* subshells and has one electron in each of the three 2*p* orbitals, in accordance with Hund's rule. These three electrons have unpaired spins. Oxygen (atomic number 8) has a pair of electrons in any one of the 2*p* orbitals (the electrons have opposite spins) and a single electron in each of the other two. Fluorine (atomic number 9) has only one 2*p* orbital containing an unpaired electron. All of the electrons in the noble gas neon (atomic number 10) are paired, and all of the orbitals in the $n = 1$ and the $n = 2$ shells are filled. The electron configurations and orbital diagrams of these four elements are:

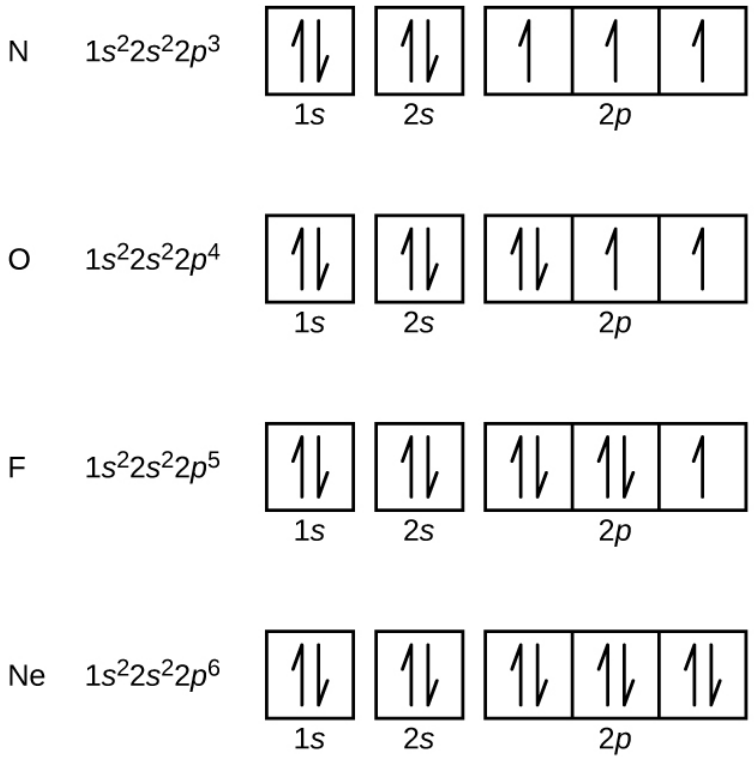

Figure **6.3.5**: Since the core electron shells correspond to noble gas electron configurations, we can abbreviate electron configurations by writing the noble gas that matches the core electron configuration, along with the valence electrons in a condensed format. For our sodium example, the symbol [Ne] represents core electrons, ($1s^2 2s^2 2p^6$) and our abbreviated or condensed configuration is [Ne]$3s^1$.

The alkali metal sodium (atomic number 11) has one more electron than the neon atom. This electron must go into the lowest-energy subshell available, the 3*s* orbital, giving a $1s^2 2s^2 2p^6 3s^1$ configuration. The electrons occupying the outermost shell orbital(s) (highest value of *n*) are called valence electrons, and those occupying the inner shell orbitals are called core electrons (Figure \PageIndex5\PageIndex5). Since the core electron shells correspond to noble gas electron configurations, we can abbreviate electron configurations by writing the noble gas that matches the core electron configuration, along with the valence electrons in a condensed format. For our sodium example, the symbol [Ne] represents core electrons, ($1s^2 2s^2 2p^6$) and our abbreviated or condensed configuration is [Ne]$3s^1$.

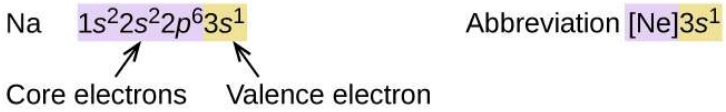

Figure **6.3.5**: A core-abbreviated electron configuration (right) replaces the core electrons with the noble gas symbol whose configuration matches the core electron configuration of the other element.

Similarly, the abbreviated configuration of lithium can be represented as [He]$2s^1$, where [He] represents the configuration of the helium atom, which is identical to that of the filled inner shell of lithium. Writing the configurations in this way emphasizes the similarity of the configurations of lithium and sodium. Both atoms, which are in the alkali metal family, have only one electron in a valence *s* subshell outside a filled set of inner shells.

$$\textbf{Li : [He]}\ 2s^1$$
$$\textbf{Na : [Ne]}\ 3s^1$$

The alkaline earth metal magnesium (atomic number 12), with its 12 electrons in a [Ne]$3s^2$ configuration, is analogous to its family member beryllium, [He]$2s^2$. Both atoms have a filled *s* subshell outside their filled inner shells. Aluminum (atomic number 13), with 13 electrons and the electron configuration [Ne]$3s^2 3p^1$, is analogous to its family member boron, [He]$2s^2 2p^1$.

The electron configurations of silicon (14 electrons), phosphorus (15 electrons), sulfur (16 electrons), chlorine (17 electrons), and argon (18 electrons) are analogous in the electron configurations of their outer shells to their corresponding family members carbon, nitrogen, oxygen, fluorine, and neon, respectively, except that the principal quantum number of the outer shell of the heavier elements has increased by one to $n = 3$. Figure **6.3.6** shows the lowest energy, or ground-state, electron configuration for these elements as well as that for atoms of each of the known elements.

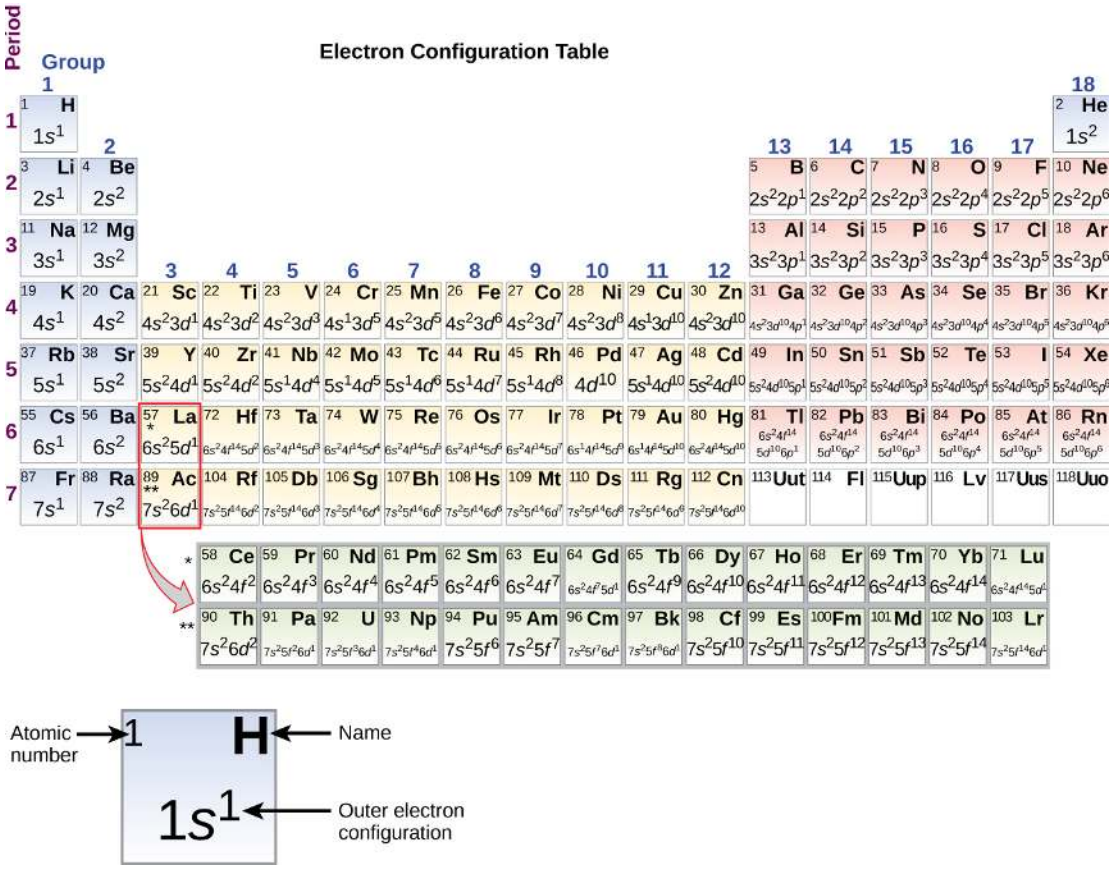

Figure **6.3.6**: This version of the periodic table shows the outer-shell electron configuration of each element. Note that down each group, the configuration is often similar.

When we come to the next element in the periodic table, the alkali metal potassium (atomic number 19), we might expect that we would begin to add electrons to the 3*d* subshell. However, all available chemical and physical evidence indicates that potassium is like lithium and sodium, and that the next electron is not added to the 3*d* level but is, instead, added to the 4*s* level (Figure **6.3.3** or **6.3.4**). As discussed previously, the 3*d* orbital with no radial nodes is higher in energy because it is less penetrating and more shielded from the nucleus than the 4*s*, which has three radial nodes. Thus, potassium has an electron configuration of $[Ar]4s^1$. Hence, potassium corresponds to Li and Na in its valence shell configuration. The next electron is added to complete the 4*s* subshell and calcium has an electron configuration of $[Ar]4s^2$. This gives calcium an outer-shell electron configuration corresponding to that of beryllium and magnesium.

Beginning with the transition metal scandium (atomic number 21), additional electrons are added successively to the 3*d* subshell. This subshell is filled to its capacity with 10 electrons (remember that for $l = 2$ [*d* orbitals], there are $2l + 1 = 5$ values of m_l, meaning that there are five *d* orbitals that have a combined capacity of 10 electrons). The 4*p* subshell fills next. Note that for three series of elements, scandium (Sc) through copper (Cu), yttrium (Y) through silver (Ag), and lutetium (Lu) through gold (Au), a total of 10 *d* electrons are successively added to the $(n - 1)$ shell next to the *n* shell to bring that $(n - 1)$ shell from 8 to 18 electrons. For two series, lanthanum (La) through lutetium (Lu) and actinium (Ac) through lawrencium (Lr), 14 *f* electrons ($l = 3$, $2l + 1 = 7$ m_l values; thus, seven orbitals with a combined capacity of 14 electrons) are successively added to the $(n - 2)$ shell to bring that shell from 18 electrons to a total of 32 electrons.

Example 6.3.1: Quantum Numbers and Electron Configurations

What is the electron configuration and orbital diagram for a phosphorus atom? What are the four quantum numbers for the last electron added?

Solution

The atomic number of phosphorus is 15. Thus, a phosphorus atom contains 15 electrons. The order of filling of the energy levels is 1*s*, 2*s*, 2*p*, 3*s*, 3*p*, 4*s*, . . . The 15 electrons of the phosphorus atom will fill up to the 3*p* orbital, which will contain three electrons:

P $1s^2 2s^2 2p^6 3s^2 3p^3$

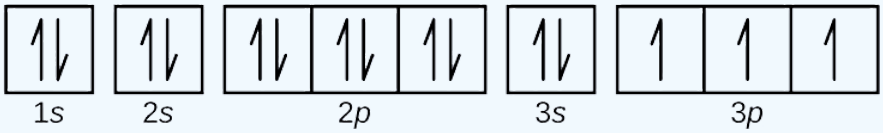

The last electron added is a 3*p* electron. Therefore, $n = 3$ and, for a *p*-type orbital, $l = 1$. The m_l value could be –1, 0, or +1. The three *p* orbitals are degenerate, so any of these m_l values is correct. For unpaired electrons, convention assigns the value of $+\frac{1}{2}$ for the spin quantum number; thus, $m_s = +\frac{1}{2}$.

Exercise 6.3.1

Identify the atoms from the electron configurations given:

a. $[Ar]4s^2 3d^5$
b. $[Kr]5s^2 4d^{10} 5p^6$

Answer a

Mn

Answer b

Xe

The periodic table can be a powerful tool in predicting the electron configuration of an element. However, we do find exceptions to the order of filling of orbitals that are shown in Figure **6.3.3** or **6.3.4**. For instance, the electron configurations of the transition metals chromium (Cr; atomic number 24) and copper (Cu; atomic number 29), among others, are not those we would expect. In general, such exceptions involve subshells with very similar energy, and small effects can lead to changes in the order of filling.

In the case of Cr and Cu, we find that half-filled and completely filled subshells apparently represent conditions of preferred stability. This stability is such that an electron shifts from the 4*s* into the 3*d* orbital to gain the extra stability of a half-filled 3*d* subshell (in Cr) or a filled 3*d* subshell (in Cu). Other exceptions also occur. For example, niobium (Nb, atomic number 41) is predicted to have the electron configuration $[Kr]5s^2 4d^3$. Experimentally, we observe that its ground-state electron configuration is actually $[Kr]5s^1 4d^4$. We can rationalize this observation by saying that the electron–electron repulsions experienced by pairing the electrons in the 5*s* orbital are larger than the gap in energy between the 5*s* and 4*d* orbitals. There is no simple method to predict the exceptions for atoms where the magnitude of the repulsions between electrons is greater than the small differences in energy between subshells.

Electron Configurations and the Periodic Table

As described earlier, the periodic table arranges atoms based on increasing atomic number so that elements with the same chemical properties recur periodically. When their electron configurations are added to the table (Figure **6.3.6**), we also see a periodic recurrence of similar electron configurations in the outer shells of these elements. Because they are in the outer shells of an atom, valence electrons play the most important role in chemical reactions. The outer electrons have the highest energy of the electrons in

an atom and are more easily lost or shared than the core electrons. Valence electrons are also the determining factor in some physical properties of the elements.

Elements in any one group (or column) have the same number of valence electrons; the alkali metals lithium and sodium each have only one valence electron, the alkaline earth metals beryllium and magnesium each have two, and the halogens fluorine and chlorine each have seven valence electrons. The similarity in chemical properties among elements of the same group occurs because they have the same number of valence electrons. It is the loss, gain, or sharing of valence electrons that defines how elements react.

It is important to remember that the periodic table was developed on the basis of the chemical behavior of the elements, well before any idea of their atomic structure was available. Now we can understand why the periodic table has the arrangement it has—the arrangement puts elements whose atoms have the same number of valence electrons in the same group. This arrangement is emphasized in Figure **6.3.6**, which shows in periodic-table form the electron configuration of the last subshell to be filled by the Aufbau principle. The colored sections of Figure **6.3.6** show the three categories of elements classified by the orbitals being filled: main group, transition, and inner transition elements. These classifications determine which orbitals are counted in the valence shell, or highest energy level orbitals of an atom.

1. **Main group elements** (sometimes called **representative elements**) are those in which the last electron added enters an *s* or a *p* orbital in the outermost shell, shown in blue and red in Figure **6.3.6**. This category includes all the nonmetallic elements, as well as many metals and the intermediate semimetallic elements. The valence electrons for main group elements are those with the highest *n* level. For example, gallium (Ga, atomic number 31) has the electron configuration [Ar]$\underline{4s^2}3d^{10}\underline{4p^1}$, which contains three valence electrons (underlined). The completely filled *d* orbitals count as core, not valence, electrons.
2. **Transition elements or transition metals**. These are metallic elements in which the last electron added enters a *d* orbital. The valence electrons (those added after the last noble gas configuration) in these elements include the *ns* and $(n - 1)$ *d* electrons. The official IUPAC definition of transition elements specifies those with partially filled *d* orbitals. Thus, the elements with completely filled orbitals (Zn, Cd, Hg, as well as Cu, Ag, and Au in Figure **6.3.6**) are not technically transition elements. However, the term is frequently used to refer to the entire *d* block (colored yellow in Figure **6.3.6**), and we will adopt this usage in this textbook.
3. **Inner transition elements** are metallic elements in which the last electron added occupies an *f* orbital. They are shown in green in Figure **6.3.6**. The valence shells of the inner transition elements consist of the $(n - 2)f$, the $(n - 1)d$, and the *ns* subshells. There are two inner transition series:
    1. The lanthanide series: lanthanide (La) through lutetium (Lu)
    2. The actinide series: actinide (Ac) through lawrencium (Lr)

Lanthanum and actinium, because of their similarities to the other members of the series, are included and used to name the series, even though they are transition metals with no *f* electrons.

Electron Configurations of Ions

We have seen that ions are formed when atoms gain or lose electrons. A cation (positively charged ion) forms when one or more electrons are removed from a parent atom. For main group elements, the electrons that were added last are the first electrons removed. For transition metals and inner transition metals, however, electrons in the *s* orbital are easier to remove than the *d* or *f* electrons, and so the highest *ns* electrons are lost, and then the $(n - 1)d$ or $(n - 2)f$ electrons are removed. An anion (negatively charged ion) forms when one or more electrons are added to a parent atom. The added electrons fill in the order predicted by the Aufbau principle.

✔ Example **6.3.2**: Predicting Electron Configurations of Ions

What is the electron configuration and orbital diagram of:

a. Na^+
b. P^{3-}
c. Al^{2+}
d. Fe^{2+}

e. Sm^{3+}

Solution

First, write out the electron configuration for each parent atom. We have chosen to show the full, unabbreviated configurations to provide more practice for students who want it, but listing the core-abbreviated electron configurations is also acceptable.

Next, determine whether an electron is gained or lost. Remember electrons are negatively charged, so ions with a positive charge have *lost* an electron. For main group elements, the last orbital gains or loses the electron. For transition metals, the last *s* orbital loses an electron before the *d* orbitals.

a. Na: $1s^2 2s^2 2p^6 3s^1$. Sodium cation loses one electron, so Na^+: $1s^2 2s^2 2p^6 3s^1 = Na^+$: $1s^2 2s^2 2p^6$.
b. P: $1s^2 2s^2 2p^6 3s^2 3p^3$. Phosphorus trianion gains three electrons, so P^{3-}: $1s^2 2s^2 2p^6 3s^2 3p^6$.
c. Al: $1s^2 2s^2 2p^6 3s^2 3p^1$. Aluminum dication loses two electrons Al^{2+}: $1s^2 2s^2 2p^6 3s^2 3p^1 = Al^{2+}$: $1s^2 2s^2 2p^6 3s^1$.
d. Fe: $1s^2 2s^2 2p^6 3s^2 3p^6 4s^2 3d^6$. Iron(II) loses two electrons and, since it is a transition metal, they are removed from the 4*s* orbital Fe^{2+}: $1s^2 2s^2 2p^6 3s^2 3p^6 4s^2 3d^6 = 1s^2 2s^2 2p^6 3s^2 3p^6 3d^6$.
e. Sm: $1s^2 2s^2 2p^6 3s^2 3p^6 4s^2 3d^{10} 4p^6 5s^2 4d^{10} 5p^6 6s^2 4f^6$. Samarium trication loses three electrons. The first two will be lost from the 6*s* orbital, and the final one is removed from the 4*f* orbital. Sm^{3+}: $1s^2 2s^2 2p^6 3s^2 3p^6 4s^2 3d^{10} 4p^6 5s^2 4d^{10} 5p^6 6s^2 4f^6 = 1s^2 2s^2 2p^6 3s^2 3p^6 4s^2 3d^{10} 4p^6 5s^2 4d^{10} 5p^6 4f^5$.

? Exercise 6.3.2

a. Which ion with a +2 charge has the electron configuration $1s^2 2s^2 2p^6 3s^2 3p^6 3d^{10} 4s^2 4p^6 4d^5$?
b. Which ion with a +3 charge has this configuration?

Answer a

Tc^{2+}

Answer b

Ru^{3+}

Summary

The relative energy of the subshells determine the order in which atomic orbitals are filled (1*s*, 2*s*, 2*p*, 3*s*, 3*p*, 4*s*, 3*d*, 4*p*, and so on). Electron configurations and orbital diagrams can be determined by applying the Pauli exclusion principle (no two electrons can have the same set of four quantum numbers) and Hund's rule (whenever possible, electrons retain unpaired spins in degenerate orbitals).

Electrons in the outermost orbitals, called valence electrons, are responsible for most of the chemical behavior of elements. In the periodic table, elements with analogous valence electron configurations usually occur within the same group. There are some exceptions to the predicted filling order, particularly when half-filled or completely filled orbitals can be formed. The periodic table can be divided into three categories based on the orbital in which the last electron to be added is placed: main group elements (*s* and *p* orbitals), transition elements (*d* orbitals), and inner transition elements (*f* orbitals).

Glossary

Aufbau principle
procedure in which the electron configuration of the elements is determined by "building" them in order of atomic numbers, adding one proton to the nucleus and one electron to the proper subshell at a time

core electron
electron in an atom that occupies the orbitals of the inner shells

electron configuration

electronic structure of an atom in its ground state given as a listing of the orbitals occupied by the electrons

Hund's rule

every orbital in a subshell is singly occupied with one electron before any one orbital is doubly occupied, and all electrons in singly occupied orbitals have the same spin

orbital diagram

pictorial representation of the electron configuration showing each orbital as a box and each electron as an arrow

valence electrons

electrons in the outermost or valence shell (highest value of *n*) of a ground-state atom; determine how an element reacts

valence shell

outermost shell of electrons in a ground-state atom; for main group elements, the orbitals with the highest *n* level (*s* and *p* subshells) are in the valence shell, while for transition metals, the highest energy *s* and *d* subshells make up the valence shell and for inner transition elements, the highest *s*, *d*, and *f* subshells are included

---

This page titled 6.3: Electronic Structure of Atoms (Electron Configurations) is shared under a CC BY license and was authored, remixed, and/or curated by OpenStax.

- **6.4: Electronic Structure of Atoms (Electron Configurations)** by OpenStax is licensed CC BY 4.0. Original source: https://openstax.org/details/books/chemistry-2e.

6.4: Periodic Variations in Element Properties

Learning Objectives

- Describe and explain the observed trends in atomic size, ionization energy, and electron affinity of the elements

The elements in groups (vertical columns) of the periodic table exhibit similar chemical behavior. This similarity occurs because the members of a group have the same number and distribution of electrons in their valence shells. However, there are also other patterns in chemical properties on the periodic table. For example, as we move down a group, the metallic character of the atoms increases. Oxygen, at the top of Group 16 (6A), is a colorless gas; in the middle of the group, selenium is a semiconducting solid; and, toward the bottom, polonium is a silver-grey solid that conducts electricity.

As we go across a period from left to right, we add a proton to the nucleus and an electron to the valence shell with each successive element. As we go down the elements in a group, the number of electrons in the valence shell remains constant, but the principal quantum number increases by one each time. An understanding of the electronic structure of the elements allows us to examine some of the properties that govern their chemical behavior. These properties vary periodically as the electronic structure of the elements changes. They are (1) size (radius) of atoms and ions, (2) ionization energies, and (3) electron affinities.

Variation in Covalent Radius

The quantum mechanical picture makes it difficult to establish a definite size of an atom. However, there are several practical ways to define the radius of atoms and, thus, to determine their relative sizes that give roughly similar values. We will use the covalent radius (Figure **6.4.1**), which is defined as one-half the distance between the nuclei of two identical atoms when they are joined by a covalent bond (this measurement is possible because atoms within molecules still retain much of their atomic identity).

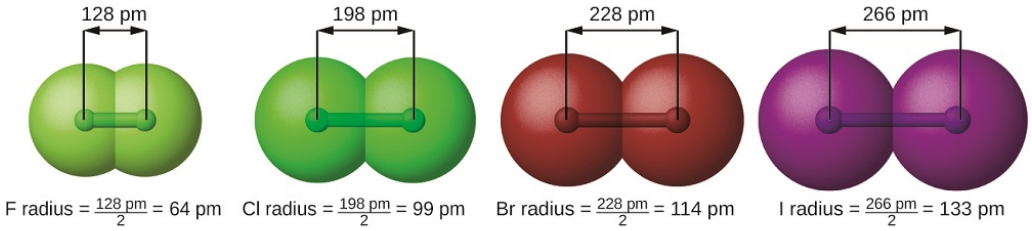

(a)

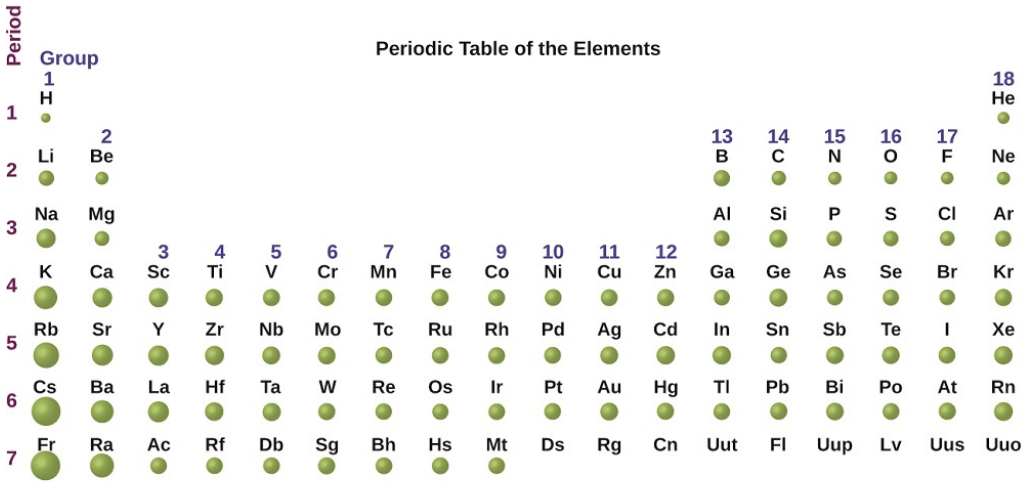

(b)

Figure **6.4.1**: (a) The radius of an atom is defined as one-half the distance between the nuclei in a molecule consisting of two identical atoms joined by a covalent bond. The atomic radius for the halogens increases down the group as n increases. (b) Covalent radii of the elements are shown to scale. The general trend is that radii increase down a group and decrease across a period.

This figure has two parts: a and b. In figure a, 4 diatomic molecules are shown to illustrate the method of determining the atomic radius of an atom. The first model, in light green, is used to find the F atom radius. Two spheres are pushed very tightly together. The distance between the centers of the two atoms is indicated above the diagram with a double headed arrow labeled, “128 p m.” The endpoints of this arrow connect to line segments that extend to the atomic radii below. Beneath the molecule is the label, “F radius equals 128 p m divided by 2 equals 64 p m.” The next three models are similarly used to show the atomic radii of additional atoms. The second diatomic molecule is in a darker shade of green. The distance between the radii is 198 p m. Beneath the molecule is the label, “C l radius equals 198 p m divided by 2 equals 99 pm.” The third diatomic molecule is in red. The distance between the radii is 228 p m. Beneath the molecule is the label, “B r radius equals 228 p m divided by 2 equals 114 pm.” The fourth diatomic molecule is in purple. The distance between the radii is 266 p m. Beneath the molecule is the label, “I radius equals 266 p m divided by 2 equals 133 p m.” In figure b, a periodic table layout is used to compare relative sizes of atoms using green spheres. No spheres are provided for the noble or inert gas, group 18 elements. General trends noted are increasing circle size moving from top to bottom in a group, with a general tendency toward increasing atomic radii toward the lower left corner of the periodic table.

We know that as we scan down a group, the principal quantum number, *n*, increases by one for each element. Thus, the electrons are being added to a region of space that is increasingly distant from the nucleus. Consequently, the size of the atom (and its covalent radius) must increase as we increase the distance of the outermost electrons from the nucleus. This trend is illustrated for the covalent radii of the halogens in Table **6.4.1** and Figure **6.4.1**. The trends for the entire periodic table can be seen in Figure **6.4.2**.

Table **6.4.1**: Covalent Radii of the Halogen Group Elements

Atom	Covalent radius (pm)	Nuclear charge
F	64	+9
Cl	99	+17
Br	114	+35
I	133	+53
At	148	+85

As shown in Figure **6.4.2**, as we move across a period from left to right, we generally find that each element has a smaller covalent radius than the element preceding it. This might seem counterintuitive because it implies that atoms with more electrons have a smaller atomic radius. This can be explained with the concept of effective nuclear charge, Z_{eff}. This is the pull exerted on a specific electron by the nucleus, taking into account any electron–electron repulsions. For hydrogen, there is only one electron and so the nuclear charge (Z) and the effective nuclear charge (Z_{eff}) are equal. For all other atoms, the inner electrons partially *shield* the outer electrons from the pull of the nucleus, and thus:

$$Z_{\text{eff}} = Z - shielding$$

Shielding is determined by the probability of another electron being between the electron of interest and the nucleus, as well as by the electron–electron repulsions the electron of interest encounters. Core electrons are adept at shielding, while electrons in the same valence shell do not block the nuclear attraction experienced by each other as efficiently. Thus, each time we move from one element to the next across a period, Z increases by one, but the shielding increases only slightly. Thus, Z_{eff} increases as we move from left to right across a period. The stronger pull (higher effective nuclear charge) experienced by electrons on the right side of the periodic table draws them closer to the nucleus, making the covalent radii smaller.

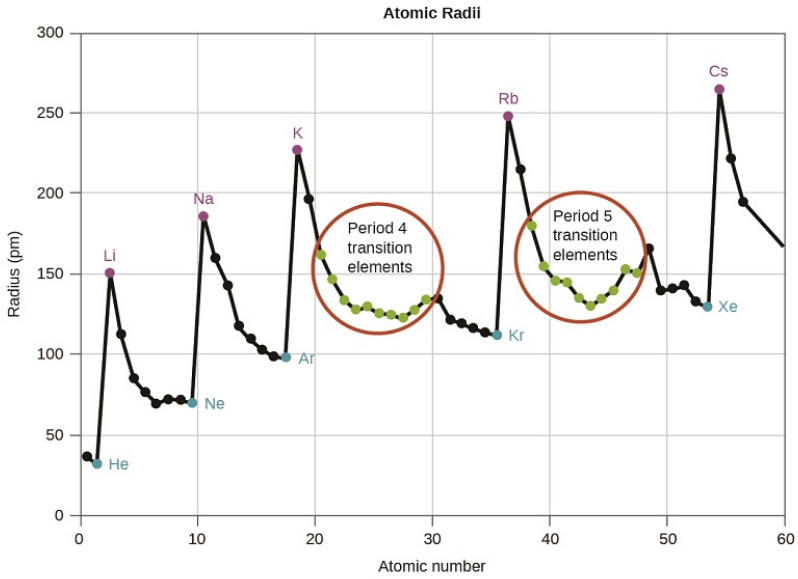

Figure **6.4.2**: Within each period, the trend in atomic radius decreases as Z increases; for example, from K to Kr. Within each group (e.g., the alkali metals shown in purple), the trend is that atomic radius increases as Z increases.

This graph is labeled Atomic Number on the horizontal axis and Radius (p m) on the vertical axis. A black jagged line connects the radii values for elements with atomic numbers 1 through 60 on the graph. Peaks are evident at the locations of the alkali metals: L i, N a, K, R b, and C s. Similarly, minima exist at the locations of noble or inert gases: H e, N e, A r, K r, X e, and R n. The locations of period 4 and period 5 transition elements are provided with green dots.

Thus, as we would expect, the outermost or valence electrons are easiest to remove because they have the highest energies, are shielded more, and are farthest from the nucleus. As a general rule, when the representative elements form cations, they do so by the loss of the *ns* or *np* electrons that were added last in the Aufbau process. The transition elements, on the other hand, lose the *ns* electrons before they begin to lose the $(n - 1)d$ electrons, even though the *ns* electrons are added first, according to the Aufbau principle.

✔ Example **6.4.1**: Sorting Atomic Radii

Predict the order of increasing covalent radius for Ge, Fl, Br, Kr.

Solution

Radius increases as we move down a group, so Ge < Fl (Note: Fl is the symbol for flerovium, element 114, NOT fluorine). Radius decreases as we move across a period, so Kr < Br < Ge. Putting the trends together, we obtain Kr < Br < Ge < Fl.

? Exercise 6.4.1

Give an example of an atom whose size is smaller than fluorine.

Answer

Ne or He

Variation in Ionic Radii

Ionic radius is the measure used to describe the size of an ion. A cation always has fewer electrons and the same number of protons as the parent atom; it is smaller than the atom from which it is derived (Figure **6.4.3**). For example, the covalent radius of an aluminum atom ($1s^2 2s^2 2p^6 3s^2 3p^1$) is 118 pm, whereas the ionic radius of an Al^{3+} ($1s^2 2s^2 2p^6$) is 68 pm. As electrons are removed from the outer valence shell, the remaining core electrons occupying smaller shells experience a greater effective nuclear charge Z_{eff} (as discussed) and are drawn even closer to the nucleus.

Figure **6.4.3**: The radius for a cation is smaller than the parent atom (Al), due to the lost electrons; the radius for an anion is larger than the parent (S), due to the gained electrons.

The figure includes spheres in green to represent the relative sizes of A l and S atoms. Beneath each of these spheres is a red sphere. The red sphere represents the ionic states of aluminum and sulfur respectively. While radius for the aluminum cation is smaller than aluminum, the sulfur anion has a greater radius than sulfur.

Cations with larger charges are smaller than cations with smaller charges (e.g., V^{2+} has an ionic radius of 79 pm, while that of V^{3+} is 64 pm). Proceeding down the groups of the periodic table, we find that cations of successive elements with the same charge generally have larger radii, corresponding to an increase in the principal quantum number, *n*.

An anion (negative ion) is formed by the addition of one or more electrons to the valence shell of an atom. This results in a greater repulsion among the electrons and a decrease in Z_{eff} per electron. Both effects (the increased number of electrons and the decreased Z_{eff}) cause the radius of an anion to be larger than that of the parent atom (Figure **6.4.3**). For example, a sulfur atom ($[Ne]3s^2 3p^4$) has a covalent radius of 104 pm, whereas the ionic radius of the sulfide anion ($[Ne]3s^2 3p^6$) is 170 pm. For consecutive elements proceeding down any group, anions have larger principal quantum numbers and, thus, larger radii.

Atoms and ions that have the same electron configuration are said to be isoelectronic. Examples of isoelectronic species are N^{3-}, O^{2-}, F^-, Ne, Na^+, Mg^{2+}, and Al^{3+} ($1s^2 2s^2 2p^6$). Another isoelectronic series is P^{3-}, S^{2-}, Cl^-, Ar, K^+, Ca^{2+}, and Sc^{3+} ($[Ne]3s^2 3p^6$). For atoms or ions that are isoelectronic, the number of protons determines the size. The greater the nuclear charge, the smaller the radius in a series of isoelectronic ions and atoms.

Variation in Ionization Energies

The amount of energy required to remove the most loosely bound electron from a gaseous atom in its ground state is called its first ionization energy (IE_1). The first ionization energy for an element, X, is the energy required to form a cation with +1 charge:

$$\mathbf{X}(g) \longrightarrow \mathbf{X}^+(g) + \mathbf{e}^- \quad \mathbf{IE_1}$$

The energy required to remove the second most loosely bound electron is called the second ionization energy (IE_2).

$$\mathbf{X}^+(g) \longrightarrow \mathbf{X}^{2+}(g) + \mathbf{e}^- \quad \mathbf{IE_2}$$

The energy required to remove the third electron is the third ionization energy, and so on. Energy is always required to remove electrons from atoms or ions, so ionization processes are endothermic and IE values are always positive. For larger atoms, the most loosely bound electron is located farther from the nucleus and so is easier to remove. Thus, as size (atomic radius) increases, the

ionization energy should decrease. Relating this logic to what we have just learned about radii, we would expect first ionization energies to decrease down a group and to increase across a period.

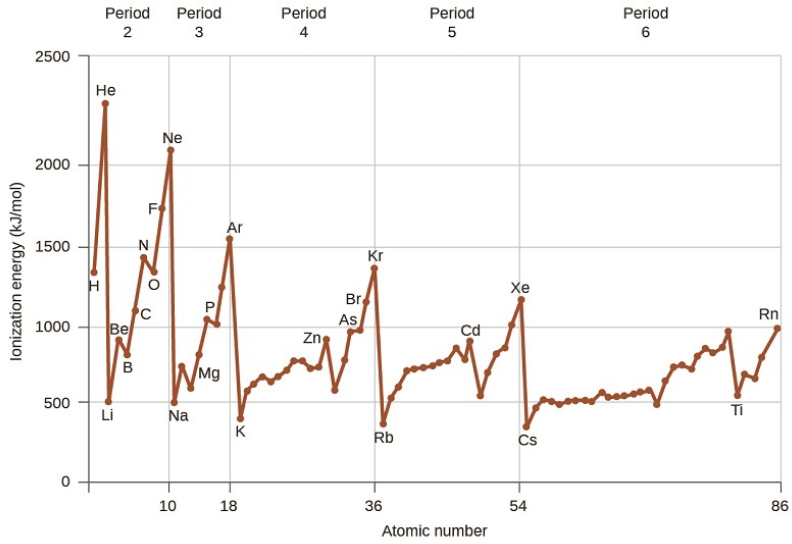

Figure 6.4.4: The first ionization energy of the elements in the first five periods are plotted against their atomic number.

This figure includes Atomic Number on the horizontal axis and, Ionization Energy (k J divided by mol) on the vertical axis. A red jagged line connects the ionization energies for elements with atomic numbers 1 through 86 on the graph. Peaks are evident at the locations of the noble or inert gases: H e, N e, A r, K r, X e, and R n. Similarly, minima exist at the locations of the alkali metals: L i, N a, K, R b, and C s.

Figure 6.4.4 graphs the relationship between the first ionization energy and the atomic number of several elements. Within a period, the values of first ionization energy for the elements (IE_1) generally increases with increasing Z. Down a group, the IE_1 value generally decreases with increasing Z. There are some systematic deviations from this trend, however. Note that the ionization energy of boron (atomic number 5) is less than that of beryllium (atomic number 4) even though the nuclear charge of boron is greater by one proton. This can be explained because the energy of the subshells increases as l increases, due to penetration and shielding (as discussed previously in this chapter). Within any one shell, the s electrons are lower in energy than the p electrons. This means that an s electron is harder to remove from an atom than a p electron in the same shell. The electron removed during the ionization of beryllium ($[He]2s^2$) is an s electron, whereas the electron removed during the ionization of boron ($[He]2s^22p^1$) is a p electron; this results in a lower first ionization energy for boron, even though its nuclear charge is greater by one proton. Thus, we see a small deviation from the predicted trend occurring each time a new subshell begins.

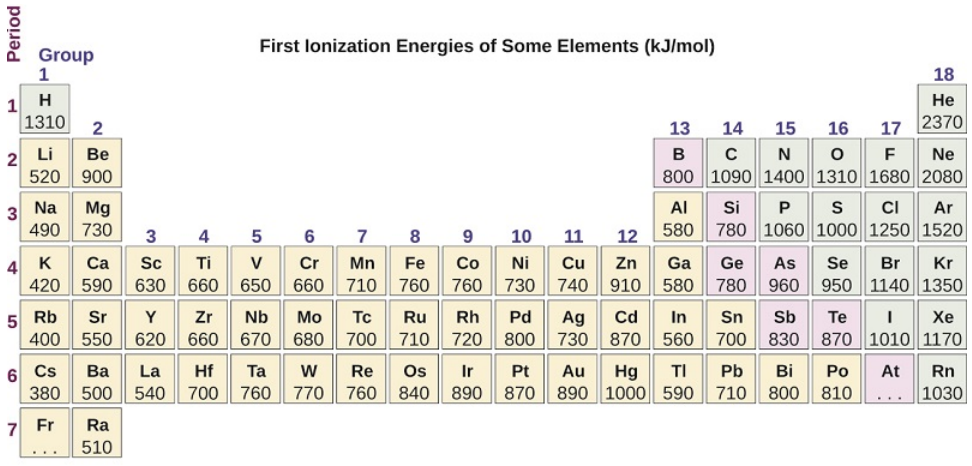

Figure 6.4.5: This version of the periodic table shows the first ionization energy of (IE: $_1$), in kJ/mol, of selected elements.

The trends for first ionization energies across periods and down groups are shown in this version of the periodic table.

Another deviation occurs as orbitals become more than one-half filled. The first ionization energy for oxygen is slightly less than that for nitrogen, despite the trend in increasing IE_1 values across a period. Looking at the orbital diagram of oxygen, we can see that removing one electron will eliminate the electron–electron repulsion caused by pairing the electrons in the 2*p* orbital and will result in a half-filled orbital (which is energetically favorable). Analogous changes occur in succeeding periods (note the dip for sulfur after phosphorus in Figure **6.4.4**.

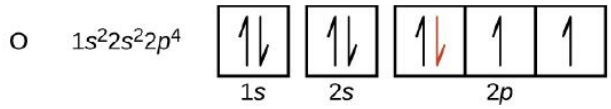

The electronic configuration for oxygen is 1s superscript 2, 2s superscript, 2p superscript 4. An orbital diagram shows 2 squares each filled with a pair of opposite pointing arrows to represent the 1s ans 2s orbitals. Each of the three connected square which represents the 2p orbitals are filled with one arrow respectively with the addition of 1 red arrow in the first of the three squares.

Removing an electron from a cation is more difficult than removing an electron from a neutral atom because of the greater electrostatic attraction to the cation. Likewise, removing an electron from a cation with a higher positive charge is more difficult than removing an electron from an ion with a lower charge. Thus, successive ionization energies for one element always increase. As seen in Table **6.4.2**, there is a large increase in the ionization energies (color change) for each element. This jump corresponds to removal of the core electrons, which are harder to remove than the valence electrons. For example, Sc and Ga both have three valence electrons, so the rapid increase in ionization energy occurs after the third ionization.

Table 6.4.2: Successive Ionization Energies for Selected Elements (kJ/mol)

Element	IE_1	IE_2	IE_3	IE_4	IE_5	IE_6	IE_7
K	418.8	3051.8	4419.6	5876.9	7975.5	9590.6	11343
Ca	589.8	1145.4	4912.4	6490.6	8153.0	10495.7	12272.9
Sc	633.1	1235.0	2388.7	7090.6	8842.9	10679.0	13315.0
Ga	578.8	1979.4	2964.6	6180	8298.7	10873.9	13594.8
Ge	762.2	1537.5	3302.1	4410.6	9021.4	Not available	Not available
As	944.5	1793.6	2735.5	4836.8	6042.9	12311.5	Not available

✔ Example 6.4.2: Ranking Ionization Energies

Predict the order of increasing energy for the following processes: IE_1 for Al, IE_1 for Tl, IE_2 for Na, IE_3 for Al.

Solution

Removing the $6p^1$ electron from Tl is easier than removing the $3p^1$ electron from Al because the higher *n* orbital is farther from the nucleus, so $IE_1(Tl) < IE_1(Al)$. Ionizing the third electron from

$$\mathbf{Al} \quad (\mathbf{Al^{2+} \longrightarrow Al^{3+} + e^-})$$

requires more energy because the cation Al^{2+} exerts a stronger pull on the electron than the neutral Al atom, so $IE_1(Al) < IE_3(Al)$. The second ionization energy for sodium removes a core electron, which is a much higher energy process than removing valence electrons. Putting this all together, we obtain:

$$IE_1(Tl) < IE_1(Al) < IE_3(Al) < IE_2(Na).$$

? Exercise 6.4.2

Which has the lowest value for IE_1: O, Po, Pb, or Ba?

Answer

Ba

Variation in Electron Affinities

The electron affinity [EA] is the energy change for the process of adding an electron to a gaseous atom to form an anion (negative ion).

$$X(g) + e^- \longrightarrow X^-(g) \quad EA_1$$

This process can be either endothermic or exothermic, depending on the element. The EA of some of the elements is given in Figure 6.4.6. You can see that many of these elements have negative values of EA, which means that energy is released when the gaseous atom accepts an electron. However, for some elements, energy is required for the atom to become negatively charged and the value of their EA is positive. Just as with ionization energy, subsequent EA values are associated with forming ions with more charge. The second EA is the energy associated with adding an electron to an anion to form a –2 ion, and so on.

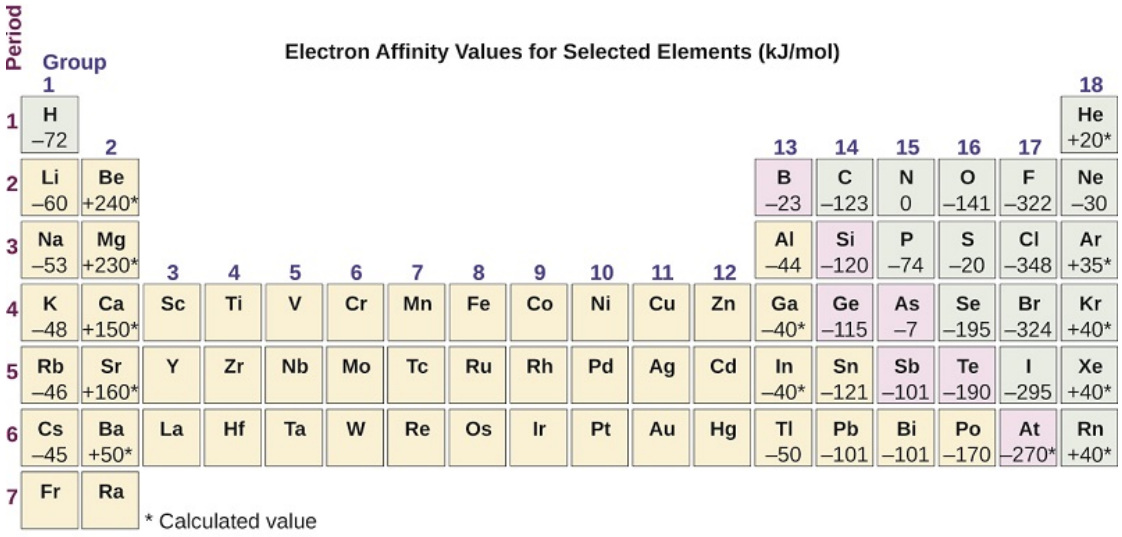

Figure 6.4.6: This version of the periodic table displays the electron affinity values (in kJ/mol) for selected elements.:
The trend for electron affinity values across periods and down groups is shown in this version of the periodic table. Values are not shown for groups 3 to 12 as well as period 7.

As we might predict, it becomes easier to add an electron across a series of atoms as the effective nuclear charge of the atoms increases. We find, as we go from left to right across a period, EAs tend to become more negative. The exceptions found among the elements of group 2 (2A), group 15 (5A), and group 18 (8A) can be understood based on the electronic structure of these groups. The noble gases, group 18 (8A), have a completely filled shell and the incoming electron must be added to a higher *n* level, which is more difficult to do. Group 2 (2A) has a filled *ns* subshell, and so the next electron added goes into the higher energy *np*, so, again, the observed EA value is not as the trend would predict. Finally, group 15 (5A) has a half-filled *np* subshell and the next electron must be paired with an existing *np* electron. In all of these cases, the initial relative stability of the electron configuration disrupts the trend in EA.

We also might expect the atom at the top of each group to have the largest EA; their first ionization potentials suggest that these atoms have the largest effective nuclear charges. However, as we move down a group, we see that the second element in the group most often has the greatest EA. The reduction of the EA of the first member can be attributed to the small size of the $n = 2$ shell and the resulting large electron–electron repulsions. For example, chlorine, with an EA value of –348 kJ/mol, has the highest value of any element in the periodic table. The EA of fluorine is –322 kJ/mol. When we add an electron to a fluorine atom to form a fluoride anion (F^-), we add an electron to the $n = 2$ shell. The electron is attracted to the nucleus, but there is also significant repulsion from the other electrons already present in this small valence shell. The chlorine atom has the same electron configuration in the valence shell, but because the entering electron is going into the $n = 3$ shell, it occupies a considerably larger region of space and the

electron–electron repulsions are reduced. The entering electron does not experience as much repulsion and the chlorine atom accepts an additional electron more readily.

The properties discussed in this section (size of atoms and ions, effective nuclear charge, ionization energies, and electron affinities) are central to understanding chemical reactivity. For example, because fluorine has an energetically favorable EA and a large energy barrier to ionization (IE), it is much easier to form fluorine anions than cations. Metallic properties including conductivity and malleability (the ability to be formed into sheets) depend on having electrons that can be removed easily. Thus, metallic character increases as we move down a group and decreases across a period in the same trend observed for atomic size because it is easier to remove an electron that is farther away from the nucleus.

Summary

Electron configurations allow us to understand many periodic trends. Covalent radius increases as we move down a group because the *n* level (orbital size) increases. Covalent radius mostly decreases as we move left to right across a period because the effective nuclear charge experienced by the electrons increases, and the electrons are pulled in tighter to the nucleus. Anionic radii are larger than the parent atom, while cationic radii are smaller, because the number of valence electrons has changed while the nuclear charge has remained constant. Ionization energy (the energy associated with forming a cation) decreases down a group and mostly increases across a period because it is easier to remove an electron from a larger, higher energy orbital. Electron affinity (the energy associated with forming an anion) is more favorable (exothermic) when electrons are placed into lower energy orbitals, closer to the nucleus. Therefore, electron affinity becomes increasingly negative as we move left to right across the periodic table and decreases as we move down a group. For both IE and electron affinity data, there are exceptions to the trends when dealing with completely filled or half-filled subshells.

Glossary

covalent radius
: one-half the distance between the nuclei of two identical atoms when they are joined by a covalent bond

effective nuclear charge
: charge that leads to the Coulomb force exerted by the nucleus on an electron, calculated as the nuclear charge minus shielding

electron affinity
: energy required to add an electron to a gaseous atom to form an anion

ionization energy
: energy required to remove an electron from a gaseous atom or ion. The associated number (e.g., second ionization energy) corresponds to the charge of the ion produced (X^{2+})

isoelectronic
: group of ions or atoms that have identical electron configurations

This page titled 6.4: Periodic Variations in Element Properties is shared under a CC BY license and was authored, remixed, and/or curated by OpenStax.

- **6.5: Periodic Variations in Element Properties** by OpenStax is licensed CC BY 4.0. Original source: https://openstax.org/details/books/chemistry-2e.

CHAPTER OVERVIEW

7: Chemical Bonding and Molecular Geometry

A general chemistry Libretexts Textmap organized around the textbook
General Chemistry -Atoms First
By OpenStax

I II III IV V VI VII VIII IX X XI XII XIII XIV XV XVI XVII XVIII XIX XX XXI ● **Homework**

A chemical bond is an attraction between atoms that allows the formation of chemical substances that contain two or more atoms. The bond is caused by the electrostatic force of attraction between opposite charges, either between electrons and nuclei, or as the result of a dipole attraction. All bonds can be explained by quantum theory, but, in practice, simplification rules allow chemists to predict the strength, directionality, and polarity of bonds. The octet rule and VSEPR theory are two examples. More sophisticated theories are valence bond theory which includes orbital hybridization and resonance, and the linear combination of atomic orbitals molecular orbital method. Electrostatics are used to describe bond polarities and the effects they have on chemical substances.

Topic hierarchy

7.1: Prelude to Chemical Bonding and Molecular Geometry
7.2: Ionic Bonding
7.3: Covalent Bonding
7.4: Lewis Symbols and Structures
7.5: Formal Charges and Resonance
7.6: Molecular Structure and Polarity
7.7: Chemical Bonding and Molecular Geometry (Exercises)

Contributors

- Paul Flowers (University of North Carolina - Pembroke), Klaus Theopold (University of Delaware) and Richard Langley (Stephen F. Austin State University) with contributing authors. Textbook content produced by OpenStax College is licensed under a Creative Commons Attribution License 4.0 license. Download for free at http://cnx.org/contents/85abf193-2bd...a7ac8df6@9.110).

This page titled 7: Chemical Bonding and Molecular Geometry is shared under a CC BY license and was authored, remixed, and/or curated by OpenStax.

7.1: Prelude to Chemical Bonding and Molecular Geometry

It has long been known that pure carbon occurs in different forms (allotropes) including graphite and diamonds. But it was not until 1985 that a new form of carbon was recognized: buckminsterfullerene, commonly known as a “buckyball.” This molecule was named after the architect and inventor R. Buckminster Fuller (1895–1983), whose signature architectural design was the geodesic dome, characterized by a lattice shell structure supporting a spherical surface. Experimental evidence revealed the formula, C_{60}, and then scientists determined how 60 carbon atoms could form one symmetric, stable molecule. They were guided by bonding theory—the topic of this chapter—which explains how individual atoms connect to form more complex structures.

Figure **7.1.1**: Nicknamed “buckyballs,” buckminsterfullerene molecules (C_{60}) contain only carbon atoms. Here they are shown in a ball-and-stick model (left). These molecules have single and double carbon-carbon bonds arranged to form a geometric framework of hexagons and pentagons, similar to the pattern on a soccer ball (center). This unconventional molecular structure is named after architect R. Buckminster Fuller, whose innovative designs combined simple geometric shapes to create large, strong structures such as this weather radar dome near Tucson, Arizona (right). (credit middle: modification of work by “Petey21”/Wikimedia Commons; credit right: modification of work by Bill Morrow).

Three figures are shown. The left figure is a many-sides spherical ball composed of hexagonal rings which have carbon atoms at each corner. The center picture shows a soccer ball. The right picture shown as water tower with sides shaped like hexagonal rings.

This page titled 7.1: Prelude to Chemical Bonding and Molecular Geometry is shared under a CC BY license and was authored, remixed, and/or curated by OpenStax.

- **7.1: Prelude to Chemical Bonding and Molecular Geometry** by OpenStax is licensed CC BY 4.0. Original source: https://openstax.org/details/books/chemistry-2e.

7.2: Ionic Bonding

Learning Objectives

- Explain the formation of cations, anions, and ionic compounds
- Predict the charge of common metallic and nonmetallic elements, and write their electron configurations

As you have learned, ions are atoms or molecules bearing an electrical charge. A cation (a positive ion) forms when a neutral atom loses one or more electrons from its valence shell, and an anion (a negative ion) forms when a neutral atom gains one or more electrons in its valence shell.

Compounds composed of ions are called ionic compounds (or salts), and their constituent ions are held together by ionic bonds: electrostatic forces of attraction between oppositely charged cations and anions. The properties of ionic compounds shed some light on the nature of ionic bonds. Ionic solids exhibit a crystalline structure and tend to be rigid and brittle; they also tend to have high melting and boiling points, which suggests that ionic bonds are very strong. Ionic solids are also poor conductors of electricity for the same reason—the strength of ionic bonds prevents ions from moving freely in the solid state. Most ionic solids, however, dissolve readily in water. Once dissolved or melted, ionic compounds are excellent conductors of electricity and heat because the ions can move about freely.

Neutral atoms and their associated ions have very different physical and chemical properties. Sodium *atoms* form sodium metal, a soft, silvery-white metal that burns vigorously in air and reacts explosively with water. Chlorine *atoms* form chlorine gas, Cl_2, a yellow-green gas that is extremely corrosive to most metals and very poisonous to animals and plants. The vigorous reaction between the elements sodium and chlorine forms the white, crystalline compound sodium chloride, common table salt, which contains sodium *cations* and chloride *anions* (Figure Figure **7.2.1**). The compound composed of these ions exhibits properties entirely different from the properties of the elements sodium and chlorine. Chlorine is poisonous, but sodium chloride is essential to life; sodium atoms react vigorously with water, but sodium chloride simply dissolves in water.

Figure **7.2.1**: (a) Sodium is a soft metal that must be stored in mineral oil to prevent reaction with air or water. (b) Chlorine is a pale yellow-green gas. (c) When combined, they form white crystals of sodium chloride (table salt). (credit a: modification of work by "Jurii"/Wikimedia Commons)

The Formation of Ionic Compounds

Binary ionic compounds are composed of just two elements: a metal (which forms the cations) and a nonmetal (which forms the anions). For example, NaCl is a binary ionic compound. We can think about the formation of such compounds in terms of the periodic properties of the elements. Many metallic elements have relatively low ionization potentials and lose electrons easily. These elements lie to the left in a period or near the bottom of a group on the periodic table. Nonmetal atoms have relatively high electron affinities and thus readily gain electrons lost by metal atoms, thereby filling their valence shells. Nonmetallic elements are found in the upper-right corner of the periodic table.

As all substances must be electrically neutral, the total number of positive charges on the cations of an ionic compound must equal the total number of negative charges on its anions. The formula of an ionic compound represents the simplest ratio of the numbers of ions necessary to give identical numbers of positive and negative charges. For example, the formula for aluminum oxide, Al_2O_3, indicates that this ionic compound contains two aluminum cations, Al^{3+}, for every three oxide anions, O^{2-} [thus, $(2 \times +3) + (3 \times -2) = 0$].

It is important to note, however, that the formula for an ionic compound does *not* represent the physical arrangement of its ions. It is incorrect to refer to a sodium chloride (NaCl) "molecule" because there is not a single ionic bond, per se, between any specific pair of sodium and chloride ions. The attractive forces between ions are isotropic—the same in all directions—meaning that any particular ion is equally attracted to all of the nearby ions of opposite charge. This results in the ions arranging themselves into a tightly bound, three-dimensional lattice structure. Sodium chloride, for example, consists of a regular arrangement of equal numbers of Na^+ cations and Cl^- anions (Figure Figure **7.2.2**).

Figure **7.2.2**: The atoms in sodium chloride (common table salt) are arranged to (a) maximize opposite charges interacting. The smaller spheres represent sodium ions, the larger ones represent chloride ions. In the expanded view (b), the geometry can be seen more clearly. Note that each ion is "bonded" to all of the surrounding ions—six in this case.

Two diagrams are shown and labeled "a" and "b." Diagram a shows a cube made up of twenty-seven alternating purple and green spheres. The purple spheres are smaller than the green spheres. Diagram b shows the same spheres, but this time, they are spread out and connected in three dimensions by white rods. The purple spheres are labeled "N superscript postive sign" while the green are labeled "C l superscript negative sign."

The strong electrostatic attraction between Na^+ and Cl^- ions holds them tightly together in solid NaCl. It requires 769 kJ of energy to dissociate one mole of solid NaCl into separate gaseous Na^+ and Cl^- ions:

$$\mathrm{NaCl}(s) \longrightarrow \mathrm{Na}^+(g) + \mathrm{Cl}^-(g) \quad \Delta H = 769\ \mathrm{kJ}$$

Electronic Structures of Cations

When forming a cation, an atom of a main group element tends to lose all of its valence electrons, thus assuming the electronic structure of the noble gas that precedes it in the periodic table. For groups 1 (the alkali metals) and 2 (the alkaline earth metals), the group numbers are equal to the numbers of valence shell electrons and, consequently, to the charges of the cations formed from atoms of these elements when all valence shell electrons are removed. For example, calcium is a group 2 element whose neutral atoms have 20 electrons and a ground state electron configuration of $1s^22s^22p^63s^23p^64s^2$. When a Ca atom loses both of its valence electrons, the result is a cation with 18 electrons, a 2+ charge, and an electron configuration of $1s^22s^22p^63s^23p^6$. The Ca^{2+} ion is therefore isoelectronic with the noble gas Ar.

For groups 12–17, the group numbers exceed the number of valence electrons by 10 (accounting for the possibility of full *d* subshells in atoms of elements in the fourth and greater periods). Thus, the charge of a cation formed by the loss of all valence electrons is equal to the group number minus 10. For example, aluminum (in group 13) forms 3+ ions (Al^{3+}).

Exceptions to the expected behavior involve elements toward the bottom of the groups. In addition to the expected ions Tl^{3+}, Sn^{4+}, Pb^{4+}, and Bi^{5+}, a partial loss of these atoms' valence shell electrons can also lead to the formation of Tl^+, Sn^{2+}, Pb^{2+}, and Bi^{3+} ions. The formation of these 1+, 2+, and 3+ cations is ascribed to the inert pair effect, which reflects the relatively low energy of the valence *s*-electron pair for atoms of the heavy elements of groups 13, 14, and 15. Mercury (group 12) also exhibits an unexpected behavior: it forms a diatomic ion, $\mathrm{Hg_2}^{2+}$ (an ion formed from two mercury atoms, with an Hg-Hg bond), in addition to the expected monatomic ion Hg^{2+} (formed from only one mercury atom).

Transition and inner transition metal elements behave differently than main group elements. Most transition metal cations have 2+ or 3+ charges that result from the loss of their outermost *s* electron(s) first, sometimes followed by the loss of one or two *d* electrons from the next-to-outermost shell. For example, iron ($1s^22s^22p^63s^23p^63d^64s^2$) forms the ion Fe^{2+} ($1s^22s^22p^63s^23p^63d^6$) by the loss of the 4*s* electrons and the ion Fe^{3+} ($1s^22s^22p^63s^23p^63d^5$) by the loss of the 4*s* electrons and one of the 3*d* electrons. Although the *d* orbitals of the transition elements are—according to the Aufbau principle—the last to fill when building up electron configurations, the outermost *s* electrons are the first to be lost when these atoms ionize. When the inner transition metals form ions, they usually have a 3+ charge, resulting from the loss of their outermost *s* electrons and a *d* or *f* electron.

✔ Example 7.2.1: Determining the Electronic Structures of Cations

There are at least 14 elements categorized as "essential trace elements" for the human body. They are called "essential" because they are required for healthy bodily functions, "trace" because they are required only in small amounts, and "elements" in spite of the fact that they are really ions. Two of these essential trace elements, chromium and zinc, are required as Cr^{3+} and Zn^{2+}. Write the electron configurations of these cations.

Solution

First, write the electron configuration for the neutral atoms:

- Zn: [Ar]$3d^{10}4s^2$
- Cr: [Ar]$3d^5 4s^1$

Next, remove electrons from the highest energy orbital. For the transition metals, electrons are removed from the *s* orbital first and then from the *d* orbital. For the *p*-block elements, electrons are removed from the *p* orbitals and then from the *s* orbital. Zinc is a member of group 12, so it should have a charge of 2+, and thus loses only the two electrons in its *s* orbital. Chromium is a transition element and should lose its *s* electrons and then its *d* electrons when forming a cation. Thus, we find the following electron configurations of the ions:

- Zn^{2+}: [Ar]$3d^{10}$
- Cr^{3+}: [Ar]$3d^3$

? Exercise 7.2.1

Potassium and magnesium are required in our diet. Write the electron configurations of the ions expected from these elements.

Answer

K^+: [Ar], Mg^{2+}: [Ne]

Electronic Structures of Anions

Most monatomic anions form when a neutral nonmetal atom gains enough electrons to completely fill its outer *s* and *p* orbitals, thereby reaching the electron configuration of the next noble gas. Thus, it is simple to determine the charge on such a negative ion: The charge is equal to the number of electrons that must be gained to fill the *s* and *p* orbitals of the parent atom. Oxygen, for example, has the electron configuration $1s^2 2s^2 2p^4$, whereas the oxygen anion has the electron configuration of the noble gas neon (Ne), $1s^2 2s^2 2p^6$. The two additional electrons required to fill the valence orbitals give the oxide ion the charge of 2– (O^{2-}).

✓ Example 7.2.2: Determining the Electronic Structure of Anions

Selenium and iodine are two essential trace elements that form anions. Write the electron configurations of the anions.

Solution

Se^{2-}: [Ar]$3d^{10}4s^2 4p^6$

I^-: [Kr]$4d^{10}5s^2 5p^6$

? Exercise 7.2.2

Write the electron configurations of a phosphorus atom and its negative ion. Give the charge on the anion.

Answer

P: [Ne]$3s^2 3p^3$

P^{3-}: [Ne]$3s^2 3p^6$

Summary

Atoms gain or lose electrons to form ions with particularly stable electron configurations. The charges of cations formed by the representative metals may be determined readily because, with few exceptions, the electronic structures of these ions have either a

noble gas configuration or a completely filled electron shell. The charges of anions formed by the nonmetals may also be readily determined because these ions form when nonmetal atoms gain enough electrons to fill their valence shells.

Glossary

inert pair effect

tendency of heavy atoms to form ions in which their valence *s* electrons are not lost

ionic bond

strong electrostatic force of attraction between cations and anions in an ionic compound

---

This page titled 7.2: Ionic Bonding is shared under a CC BY license and was authored, remixed, and/or curated by OpenStax.

- **7.2: Ionic Bonding** by OpenStax is licensed CC BY 4.0. Original source: https://openstax.org/details/books/chemistry-2e.

7.3: Covalent Bonding

Learning Objectives

- Describe the formation of covalent bonds
- Define electronegativity and assess the polarity of covalent bonds

In ionic compounds, electrons are transferred between atoms of different elements to form ions. But this is not the only way that compounds can be formed. Atoms can also make chemical bonds by sharing electrons between each other. Such bonds are called covalent bonds. Covalent bonds are formed between two atoms when both have similar tendencies to attract electrons to themselves (i.e., when both atoms have identical or fairly similar ionization energies and electron affinities). For example, two hydrogen atoms bond covalently to form an H_2 molecule; each hydrogen atom in the H_2 molecule has two electrons stabilizing it, giving each atom the same number of valence electrons as the noble gas He.

Compounds that contain covalent bonds exhibit different physical properties than ionic compounds. Because the attraction between molecules, which are electrically neutral, is weaker than that between electrically charged ions, covalent compounds generally have much lower melting and boiling points than ionic compounds. In fact, many covalent compounds are liquids or gases at room temperature, and, in their solid states, they are typically much softer than ionic solids. Furthermore, whereas ionic compounds are good conductors of electricity when dissolved in water, most covalent compounds, being electrically neutral, are poor conductors of electricity in any state.

Formation of Covalent Bonds

Nonmetal atoms frequently form covalent bonds with other nonmetal atoms. For example, the hydrogen molecule, H_2, contains a covalent bond between its two hydrogen atoms. Figure **7.3.1** illustrates why this bond is formed. Starting on the far right, we have two separate hydrogen atoms with a particular potential energy, indicated by the red line. Along the *x*-axis is the distance between the two atoms. As the two atoms approach each other (moving left along the *x*-axis), their valence orbitals (1*s*) begin to overlap. The single electrons on each hydrogen atom then interact with both atomic nuclei, occupying the space around both atoms. The strong attraction of each shared electron to both nuclei stabilizes the system, and the potential energy decreases as the bond distance decreases. If the atoms continue to approach each other, the positive charges in the two nuclei begin to repel each other, and the potential energy increases. The bond length is determined by the distance at which the lowest potential energy is achieved.

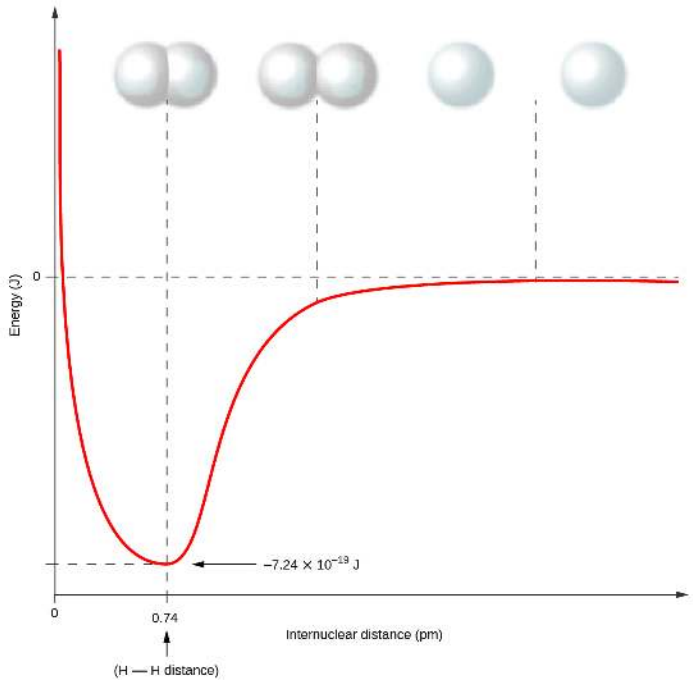

Figure **7.3.1**: *The potential energy of two separate hydrogen atoms (right) decreases as they approach each other, and the single electrons on each atom are shared to form a covalent bond. The bond length is the internuclear distance at which the lowest potential energy is achieved.*

It is essential to remember that energy must be added to break chemical bonds (an endothermic process), whereas forming chemical bonds releases energy (an exothermic process). In the case of H_2, the covalent bond is very strong; a large amount of energy, 436 kJ, must be added to break the bonds in one mole of hydrogen molecules and cause the atoms to separate:

$$\mathrm{H_2}(g) \longrightarrow 2\,\mathrm{H}(g) \quad \Delta H = 436\ \mathrm{kJ}$$

Conversely, the same amount of energy is released when one mole of H_2 molecules forms from two moles of H atoms:

$$2\,\mathrm{H}(g) \longrightarrow \mathrm{H_2}(g) \quad \Delta H = -436\ \mathrm{kJ}$$

Pure vs. Polar Covalent Bonds

If the atoms that form a covalent bond are identical, as in H_2, Cl_2, and other diatomic molecules, then the electrons in the bond must be shared equally. We refer to this as a pure covalent bond. Electrons shared in pure covalent bonds have an equal probability of being near each nucleus. In the case of Cl_2, each atom starts off with seven valence electrons, and each Cl shares one electron with the other, forming one covalent bond:

$$\mathrm{Cl} + \mathrm{Cl} \longrightarrow \mathrm{Cl_2}$$

The total number of electrons around each individual atom consists of six nonbonding electrons and two shared (i.e., bonding) electrons for eight total electrons, matching the number of valence electrons in the noble gas argon. Since the bonding atoms are identical, Cl_2 also features a pure covalent bond.

When the atoms linked by a covalent bond are different, the bonding electrons are shared, but no longer equally. Instead, the bonding electrons are more attracted to one atom than the other, giving rise to a shift of electron density toward that atom. This unequal distribution of electrons is known as a polar covalent bond, characterized by a partial positive charge on one atom and a partial negative charge on the other. The atom that attracts the electrons more strongly acquires the partial negative charge and vice versa. For example, the electrons in the H–Cl bond of a hydrogen chloride molecule spend more time near the chlorine atom than near the hydrogen atom. Thus, in an HCl molecule, the chlorine atom carries a partial negative charge and the hydrogen atom has a partial positive charge. Figure **7.3.2** shows the distribution of electrons in the H–Cl bond. Note that the shaded area around Cl is much larger than it is around H. Compare this to Figure **7.3.1**, which shows the even distribution of electrons in the H_2 nonpolar bond.

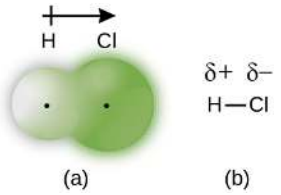

Figure **7.3.2**: (a) The distribution of electron density in the HCl molecule is uneven. The electron density is greater around the chlorine nucleus. The small, black dots indicate the location of the hydrogen and chlorine nuclei in the molecule. (b) Symbols δ+ and δ– indicate the polarity of the H–Cl bond.

We sometimes designate the positive and negative atoms in a polar covalent bond using a lowercase Greek letter "delta," δ, with a plus sign or minus sign to indicate whether the atom has a partial positive charge (δ+) or a partial negative charge (δ–). This symbolism is shown for the H–Cl molecule in Figure **7.3.2***b*.

Electronegativity

Whether a bond is nonpolar or polar covalent is determined by a property of the bonding atoms called electronegativity. Electronegativity is a measure of the tendency of an atom to attract electrons (or electron density) towards itself. It determines how the shared electrons are distributed between the two atoms in a bond. The more strongly an atom attracts the electrons in its bonds, the larger its electronegativity. Electrons in a polar covalent bond are shifted toward the more electronegative atom; thus, the more electronegative atom is the one with the partial negative charge. The greater the difference in electronegativity, the more polarized the electron distribution and the larger the partial charges of the atoms.

Figure **7.3.3** shows the electronegativity values of the elements as proposed by one of the most famous chemists of the twentieth century: Linus Pauling. In general, electronegativity increases from left to right across a period in the periodic table and decreases down a group. Thus, the nonmetals, which lie in the upper right, tend to have the highest electronegativities, with fluorine the most electronegative element of all (EN = 4.0). Metals tend to be less electronegative elements, and the group 1 metals have the lowest electronegativities. Note that noble gases are excluded from this figure because these atoms usually do not share electrons with others atoms since they have a full valence shell. (While noble gas compounds such as XeO_2 do exist, they can only be formed under extreme conditions, and thus they do not fit neatly into the general model of electronegativity.)

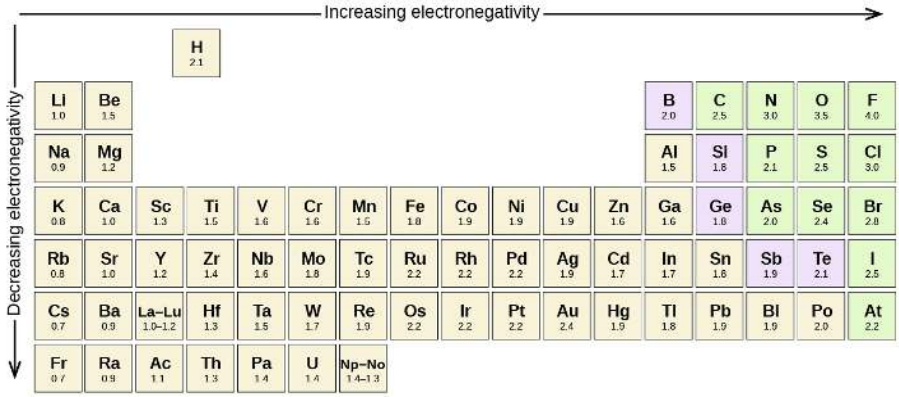

Figure **7.3.3**: The electronegativity values derived by Pauling follow predictable periodic trends with the higher electronegativities toward the upper right of the periodic table.

Linus Pauling

Linus Pauling is the only person to have received two unshared (individual) Nobel Prizes: one for chemistry in 1954 for his work on the nature of chemical bonds and one for peace in 1962 for his opposition to weapons of mass destruction. He developed many of the theories and concepts that are foundational to our current understanding of chemistry, including electronegativity and resonance structures.

Linus Pauling (1901–1994) made many important contributions to the field of chemistry. He was also a prominent activist, publicizing issues related to health and nuclear weapons.

Pauling also contributed to many other fields besides chemistry. His research on sickle cell anemia revealed the cause of the disease—the presence of a genetically inherited abnormal protein in the blood—and paved the way for the field of molecular genetics. His work was also pivotal in curbing the testing of nuclear weapons; he proved that radioactive fallout from nuclear testing posed a public health risk.

Electronegativity versus Electron Affinity

We must be careful not to confuse electronegativity and electron affinity. The electron affinity of an element is a measurable physical quantity, namely, the energy released or absorbed when an isolated gas-phase atom acquires an electron, measured in kJ/mol. Electronegativity, on the other hand, describes how tightly an atom attracts electrons in a bond. It is a dimensionless quantity that is calculated, not measured. Pauling derived the first electronegativity values by comparing the amounts of energy required to break different types of bonds. He chose an arbitrary relative scale ranging from 0 to 4.

Electronegativity and Bond Type

The absolute value of the difference in electronegativity (ΔEN) of two bonded atoms provides a rough measure of the polarity to be expected in the bond and, thus, the bond type. When the difference is very small or zero, the bond is covalent and nonpolar. When it is large, the bond is polar covalent or ionic. The absolute values of the electronegativity differences between the atoms in the bonds H–H, H–Cl, and Na–Cl are 0 (nonpolar), 0.9 (polar covalent), and 2.1 (ionic), respectively. The degree to which electrons are shared between atoms varies from completely equal (pure covalent bonding) to not at all (ionic bonding). Figure **7.3.4** shows the relationship between electronegativity difference and bond type.

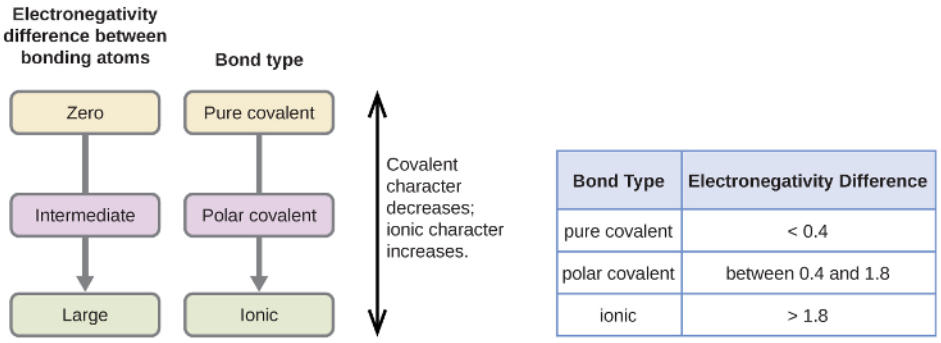

Bond Type	Electronegativity Difference
pure covalent	< 0.4
polar covalent	between 0.4 and 1.8
ionic	> 1.8

Figure **7.3.4**: As the electronegativity difference increases between two atoms, the bond becomes more ionic.

A rough approximation of the electronegativity differences associated with covalent, polar covalent, and ionic bonds is shown in Figure **7.3.4**. This table is just a general guide, however, with many exceptions. For example, the H and F atoms in HF have an electronegativity difference of 1.9, and the N and H atoms in NH_3 a difference of 0.9, yet both of these compounds form bonds that are considered polar covalent. Likewise, the Na and Cl atoms in NaCl have an electronegativity difference of 2.1, and the Mn and I atoms in MnI_2 have a difference of 1.0, yet both of these substances form ionic compounds.

The best guide to the covalent or ionic character of a bond is to consider the types of atoms involved and their relative positions in the periodic table. Bonds between two nonmetals are generally covalent; bonding between a metal and a nonmetal is often ionic.

Some compounds contain both covalent and ionic bonds. The atoms in polyatomic ions, such as OH^-, NO_3^-, and NH_4^+, are held together by polar covalent bonds. However, these polyatomic ions form ionic compounds by combining with ions of opposite charge. For example, potassium nitrate, KNO_3, contains the K^+ cation and the polyatomic NO_3^- anion. Thus, bonding in potassium nitrate is ionic, resulting from the electrostatic attraction between the ions K^+ and NO_3^-, as well as covalent between the nitrogen and oxygen atoms in NO_3^-.

Example 7.3.1: Electronegativity and Bond Polarity

Bond polarities play an important role in determining the structure of proteins. Using the electronegativity values in Table A2, arrange the following covalent bonds—all commonly found in amino acids—in order of increasing polarity. Then designate the positive and negative atoms using the symbols δ+ and δ–:

C–H, C–N, C–O, N–H, O–H, S–H

Solution

The polarity of these bonds increases as the absolute value of the electronegativity difference increases. The atom with the δ– designation is the more electronegative of the two. Table 7.3.1 shows these bonds in order of increasing polarity.

Table 7.3.1: Bond Polarity and Electronegativity Difference

Bond	ΔEN	Polarity
C–H	0.4	$\overset{\delta-}{C}-\overset{\delta+}{H}$
S–H	0.4	$\overset{\delta-}{S}-\overset{\delta+}{H}$
C–N	0.5	$\overset{\delta+}{C}-\overset{\delta-}{N}$
N–H	0.9	$\overset{\delta-}{N}-\overset{\delta+}{H}$
C–O	1.0	$\overset{\delta+}{C}-\overset{\delta-}{O}$
O–H	1.4	$\overset{\delta-}{O}-\overset{\delta+}{H}$

Exercise 7.3.1

Silicones are polymeric compounds containing, among others, the following types of covalent bonds: Si–O, Si–C, C–H, and C–C. Using the electronegativity values in Figure 7.3.3, arrange the bonds in order of increasing polarity and designate the positive and negative atoms using the symbols δ+ and δ–.

Answer

Answer to Exercise 7.2.1

Bond	Electronegativity Difference	Polarity
C–C	0.0	nonpolar
C–H	0.4	$\overset{\delta-}{C}-\overset{\delta+}{H}$
Si–C	0.7	$\overset{\delta+}{Si}-\overset{\delta-}{C}$
Si–O	1.7	$\overset{\delta+}{Si}-\overset{\delta-}{O}$

Summary

Covalent bonds form when electrons are shared between atoms and are attracted by the nuclei of both atoms. In pure covalent bonds, the electrons are shared equally. In polar covalent bonds, the electrons are shared unequally, as one atom exerts a stronger force of attraction on the electrons than the other. The ability of an atom to attract a pair of electrons in a chemical bond is called its

electronegativity. The difference in electronegativity between two atoms determines how polar a bond will be. In a diatomic molecule with two identical atoms, there is no difference in electronegativity, so the bond is nonpolar or pure covalent. When the electronegativity difference is very large, as is the case between metals and nonmetals, the bonding is characterized as ionic.

Glossary

bond length
distance between the nuclei of two bonded atoms at which the lowest potential energy is achieved

covalent bond
bond formed when electrons are shared between atoms

electronegativity
tendency of an atom to attract electrons in a bond to itself

polar covalent bond
covalent bond between atoms of different electronegativities; a covalent bond with a positive end and a negative end

pure covalent bond
(also, nonpolar covalent bond) covalent bond between atoms of identical electronegativities

---

This page titled 7.3: Covalent Bonding is shared under a CC BY license and was authored, remixed, and/or curated by OpenStax.

- **7.3: Covalent Bonding** by OpenStax is licensed CC BY 4.0. Original source: https://openstax.org/details/books/chemistry-2e.

7.4: Lewis Symbols and Structures

Learning Objectives

- Write Lewis symbols for neutral atoms and ions
- Draw Lewis structures depicting the bonding in simple molecules

Thus far, we have discussed the various types of bonds that form between atoms and/or ions. In all cases, these bonds involve the sharing or transfer of valence shell electrons between atoms. In this section, we will explore the typical method for depicting valence shell electrons and chemical bonds, namely Lewis symbols and Lewis structures.

Lewis Symbols

We use Lewis symbols to describe valence electron configurations of atoms and monatomic ions. A Lewis symbol consists of an elemental symbol surrounded by one dot for each of its valence electrons:

Figure **7.4.1** shows the Lewis symbols for the elements of the third period of the periodic table. Electron dots are typically arranged in four pairs located on the four "sides" of the atomic symbol.

Atoms	Electronic Configuration	Lewis Symbol
sodium	$[Ne]3s^1$	Na•
magnesium	$[Ne]3s^2$	•Mg•
aluminum	$[Ne]3s^23p^1$	•Al•
silicon	$[Ne]3s^23p^2$	•Si•
phosphorus	$[Ne]3s^23p^3$	•P•
sulfur	$[Ne]3s^23p^4$	:S•
chlorine	$[Ne]3s^23p^5$	:Cl•
argon	$[Ne]3s^23p^6$	:Ar:

Figure **7.4.1**: Lewis symbols illustrating the number of valence electrons for each element in the third period of the periodic table.

Lewis symbols can be used to illustrate the formation of cations from atoms, as shown here for sodium and calcium:

Likewise, they can be used to show the formation of anions from atoms, as shown here for chlorine and sulfur:

Figure **7.4.2** demonstrates the use of Lewis symbols to show the transfer of electrons during the formation of ionic compounds.

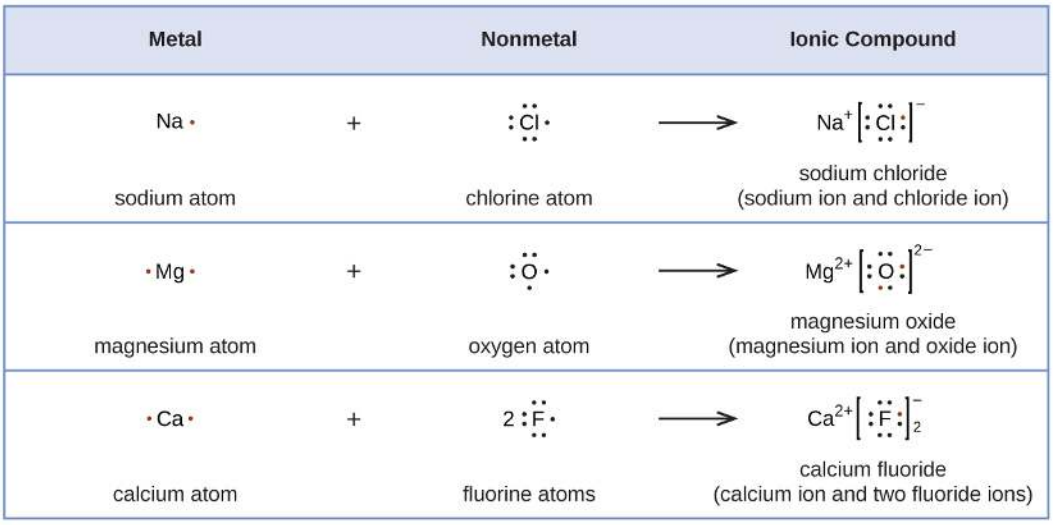

Figure **7.4.2**: Cations are formed when atoms lose electrons, represented by fewer Lewis dots, whereas anions are formed by atoms gaining electrons. The total number of electrons does not change.

Lewis Structures

We also use Lewis symbols to indicate the formation of covalent bonds, which are shown in Lewis structures, drawings that describe the bonding in molecules and polyatomic ions. For example, when two chlorine atoms form a chlorine molecule, they share one pair of electrons:

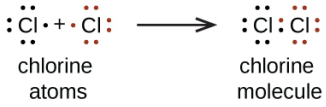

The Lewis structure indicates that each Cl atom has three pairs of electrons that are not used in bonding (called lone pairs) and one shared pair of electrons (written between the atoms). A dash (or line) is usually used to indicate a shared pair of electrons:

In the Lewis model, a single shared pair of electrons is a single bond. Each Cl atom interacts with eight valence electrons total: the six in the lone pairs and the two in the single bond.

The Octet Rule

The other halogen molecules (F_2, Br_2, I_2, and At_2) form bonds like those in the chlorine molecule: one single bond between atoms and three lone pairs of electrons per atom. This allows each halogen atom to have a noble gas electron configuration. The tendency of main group atoms to form enough bonds to obtain eight valence electrons is known as the octet rule.

The number of bonds that an atom can form can often be predicted from the number of electrons needed to reach an octet (eight valence electrons); this is especially true of the nonmetals of the second period of the periodic table (C, N, O, and F). For example, each atom of a group 14 element has four electrons in its outermost shell and therefore requires four more electrons to reach an octet. These four electrons can be gained by forming four covalent bonds, as illustrated here for carbon in CCl_4 (carbon tetrachloride) and silicon in SiH_4 (silane). Because hydrogen only needs two electrons to fill its valence shell, it is an exception to the octet rule and only needs to form one bond. The transition elements and inner transition elements also do not follow the octet rule since they have d and f electrons involved in their valence shells.

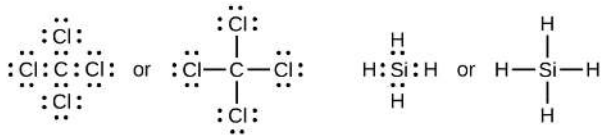

carbon tetrachloride silane

Group 15 elements such as nitrogen have five valence electrons in the atomic Lewis symbol: one lone pair and three unpaired electrons. To obtain an octet, these atoms form three covalent bonds, as in NH_3 (ammonia). Oxygen and other atoms in group 16 obtain an octet by forming two covalent bonds:

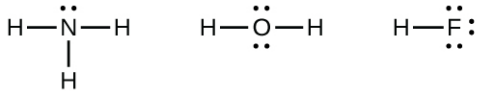

ammonia Water hydrogen fluoride

Double and Triple Bonds

As previously mentioned, when a pair of atoms shares one pair of electrons, we call this a single bond. However, a pair of atoms may need to share more than one pair of electrons in order to achieve the requisite octet. A double bond forms when two pairs of electrons are shared between a pair of atoms, as between the carbon and oxygen atoms in CH_2O (formaldehyde) and between the two carbon atoms in C_2H_4 (ethylene):

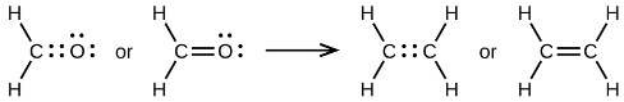

formaldehyde ethylene

A triple bond forms when three electron pairs are shared by a pair of atoms, as in carbon monoxide (CO) and the cyanide ion (CN^-):

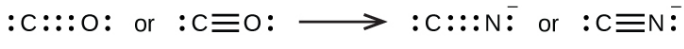

carbon monoxide cyanide ion

Writing Lewis Structures with the Octet Rule

For very simple molecules and molecular ions, we can write the Lewis structures by merely pairing up the unpaired electrons on the constituent atoms. See these examples:

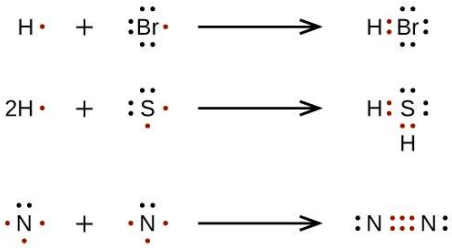

For more complicated molecules and molecular ions, it is helpful to follow the step-by-step procedure outlined here:

1. Determine the total number of valence (outer shell) electrons among all the atoms. For cations, subtract one electron for each positive charge. For anions, add one electron for each negative charge.
2. Draw a skeleton structure of the molecule or ion, arranging the atoms around a central atom. (Generally, the least electronegative element should be placed in the center.) Connect each atom to the central atom with a single bond (one electron pair).

3. Distribute the remaining electrons as lone pairs on the terminal atoms (except hydrogen), completing an octet around each atom.
4. Place all remaining electrons on the central atom.
5. Rearrange the electrons of the outer atoms to make multiple bonds with the central atom in order to obtain octets wherever possible.

Let us determine the Lewis structures of SiH_4, CHO_2^-, NO^+, and OF_2 as examples in following this procedure:

1. Determine the total number of valence (outer shell) electrons in the molecule or ion.
   - For a molecule, we add the number of valence electrons on each atom in the molecule:

$$\begin{aligned} &SiH_4 && (7.4.1)\\ &\text{Si: 4 valence electrons/atom} \times \text{1 atom} = 4 && (7.4.2)\\ &+\text{H: 1 valence electron/atom} \times \text{4 atoms} = 4 && (7.4.3)\\ &\qquad = \text{8 valence electrons} && (7.4.4)\end{aligned}$$

   - For a *negative ion*, such as CHO_2^-, we add the number of valence electrons on the atoms to the number of negative charges on the ion (one electron is gained for each single negative charge):

$$\begin{aligned} &CHO_2^-\\ &\text{C: 4 valence electrons/atom} \times \text{1 atom} = 4\\ &\text{H: 1 valence electron/atom} \times \text{1 atom} = 1\\ &\text{O: 6 valence electrons/atom} \times \text{2 atoms} = 12\\ &+ \qquad \text{1 additional electron} = 1\\ &\qquad = \text{18 valence electrons}\end{aligned}$$

   - For a *positive ion*, such as NO^+, we add the number of valence electrons on the atoms in the ion and then subtract the number of positive charges on the ion (one electron is lost for each single positive charge) from the total number of valence electrons:

$$\begin{aligned} &NO^+\\ &\text{N: 5 valence electrons/atom} \times \text{1 atom} = 5\\ &\text{O: 6 valence electron/atom} \times \text{1 atom} = 6\\ &+ -1 \text{ electron (positive charge)} \quad = -1\\ &\qquad = \text{10 valence electrons}\end{aligned}$$

   - Since OF_2 is a neutral molecule, we simply add the number of valence electrons:

$$\begin{aligned} &OF_2\\ &\text{O: 6 valence electrons/atom} \times \text{1 atom} = 6\\ &+ \text{F: 7 valence electrons/atom} \times \text{2 atoms} = 14\\ &\qquad = \text{20 valence electrons}\end{aligned}$$

2. Draw a skeleton structure of the molecule or ion, arranging the atoms around a central atom and connecting each atom to the central atom with a single (one electron pair) bond. (Note that we denote ions with brackets around the structure, indicating the charge outside the brackets:)

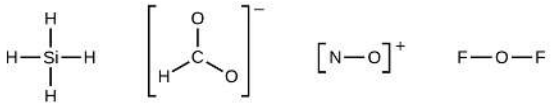

3. When several arrangements of atoms are possible, as for CHO_2^-, we must use experimental evidence to choose the correct one. In general, the less electronegative elements are more likely to be central atoms. In CHO_2^-, the less electronegative carbon atom occupies the central position with the oxygen and hydrogen atoms surrounding it. Other examples include P in $POCl_3$, S in SO_2, and Cl in ClO_4^-. An exception is that hydrogen is almost never a central atom. As the most electronegative element, fluorine also cannot be a central atom.
4. Distribute the remaining electrons as lone pairs on the terminal atoms (except hydrogen) to complete their valence shells with an octet of electrons.
   - There are no remaining electrons on SiH_4, so it is unchanged:

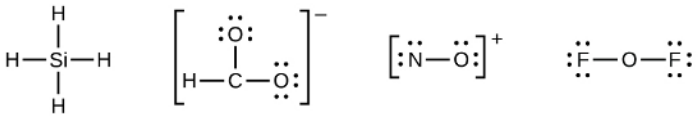

5. Place all remaining electrons on the central atom.
   - For SiH_4, CHO_2^-, and NO^+, there are no remaining electrons; we already placed all of the electrons determined in Step 1.
   - For OF_2, we had 16 electrons remaining in Step 3, and we placed 12, leaving 4 to be placed on the central atom:

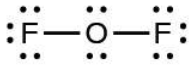

6. Rearrange the electrons of the outer atoms to make multiple bonds with the central atom in order to obtain octets wherever possible.
   - SiH_4: Si already has an octet, so nothing needs to be done.
   - CHO_2^-: We have distributed the valence electrons as lone pairs on the oxygen atoms, but the carbon atom lacks an octet:



- NO^+: For this ion, we added eight outer electrons, but neither atom has an octet. We cannot add any more electrons since we have already used the total that we found in Step 1, so we must move electrons to form a multiple bond:

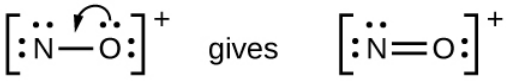

- This still does not produce an octet, so we must move another pair, forming a triple bond:

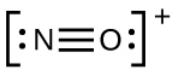

- In OF_2, each atom has an octet as drawn, so nothing changes.

Example 7.4.1: Writing Lewis Structures

NASA's Cassini-Huygens mission detected a large cloud of toxic hydrogen cyanide (HCN) on Titan, one of Saturn's moons. Titan also contains ethane (H_3CCH_3), acetylene (HCCH), and ammonia (NH_3). What are the Lewis structures of these molecules?

Solution

Calculate the number of valence electrons.

- HCN: (1 × 1) + (4 × 1) + (5 × 1) = 10
- H_3CCH_3: (1 × 3) + (2 × 4) + (1 × 3) = 14
- HCCH: (1 × 1) + (2 × 4) + (1 × 1) = 10
- NH_3: (5 × 1) + (3 × 1) = 8

Draw a skeleton and connect the atoms with single bonds. Remember that H is never a central atom:

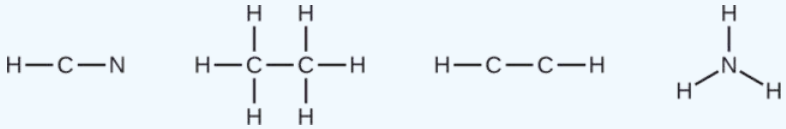

Where needed, distribute electrons to the terminal atoms:

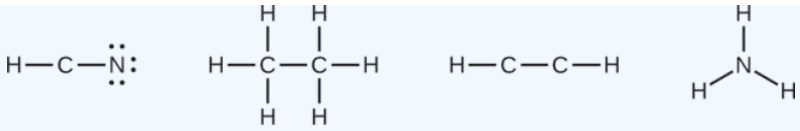

- HCN: six electrons placed on N
- H_3CCH_3: no electrons remain
- HCCH: no terminal atoms capable of accepting electrons
- NH_3: no terminal atoms capable of accepting electrons

Where needed, place remaining electrons on the central atom:

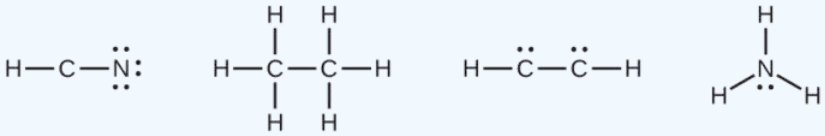

- HCN: no electrons remain
- H_3CCH_3: no electrons remain
- HCCH: four electrons placed on carbon
- NH_3: two electrons placed on nitrogen

Where needed, rearrange electrons to form multiple bonds in order to obtain an octet on each atom:

- HCN: form two more C–N bonds
- H_3CCH_3: all atoms have the correct number of electrons
- HCCH: form a triple bond between the two carbon atoms
- NH_3: all atoms have the correct number of electrons

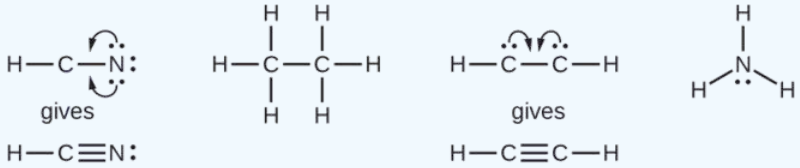

? Exercise 7.4.1

Both carbon monoxide, CO, and carbon dioxide, CO_2, are products of the combustion of fossil fuels. Both of these gases also cause problems: CO is toxic and CO_2 has been implicated in global climate change. What are the Lewis structures of these two molecules?

Answer



Fullerene Chemistry

Carbon soot has been known to man since prehistoric times, but it was not until fairly recently that the molecular structure of the main component of soot was discovered. In 1996, the Nobel Prize in Chemistry was awarded to Richard Smalley, Robert Curl, and Harold Kroto for their work in discovering a new form of carbon, the C_{60} buckminsterfullerene molecule. An entire class of compounds, including spheres and tubes of various shapes, were discovered based on C_{60}. This type of molecule, called a fullerene, consists of a complex network of single- and double-bonded carbon atoms arranged in such a way that each carbon atom obtains a full octet of electrons. Because of their size and shape, fullerenes can encapsulate other molecules, so they have shown potential in various applications from hydrogen storage to targeted drug delivery systems. They also possess unique electronic and optical properties that have been put to good use in solar powered devices and chemical sensors.

Exceptions to the Octet Rule

Many covalent molecules have central atoms that do not have eight electrons in their Lewis structures. These molecules fall into three categories:

- Odd-electron molecules have an odd number of valence electrons, and therefore have an unpaired electron.
- Electron-deficient molecules have a central atom that has fewer electrons than needed for a noble gas configuration.
- Hypervalent molecules have a central atom that has more electrons than needed for a noble gas configuration.

Odd-electron Molecules

We call molecules that contain an odd number of electrons free radicals. Nitric oxide, NO, is an example of an odd-electron molecule; it is produced in internal combustion engines when oxygen and nitrogen react at high temperatures.

To draw the Lewis structure for an odd-electron molecule like NO, we follow the same five steps we would for other molecules, but with a few minor changes:

1. *Determine the total number of valence (outer shell) electrons*. The sum of the valence electrons is 5 (from N) + 6 (from O) = 11. The odd number immediately tells us that we have a free radical, so we know that not every atom can have eight electrons in its valence shell.
2. *Draw a skeleton structure of the molecule*. We can easily draw a skeleton with an N–O single bond: N–O
3. *Distribute the remaining electrons as lone pairs on the terminal atoms*. In this case, there is no central atom, so we distribute the electrons around both atoms. We give eight electrons to the more electronegative atom in these situations; thus oxygen has the filled valence shell:

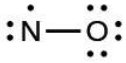

4. *Place all remaining electrons on the central atom*. Since there are no remaining electrons, this step does not apply.
5. *Rearrange the electrons to make multiple bonds with the central atom in order to obtain octets wherever possible.* We know that an odd-electron molecule cannot have an octet for every atom, but we want to get each atom as close to an octet as possible. In this case, nitrogen has only five electrons around it. To move closer to an octet for nitrogen, we take one of the lone pairs from oxygen and use it to form a NO double bond. (We cannot take another lone pair of electrons on oxygen and form a triple bond because nitrogen would then have nine electrons:)

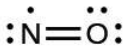

Electron-deficient Molecules

We will also encounter a few molecules that contain central atoms that do not have a filled valence shell. Generally, these are molecules with central atoms from groups 2 and 13 and outer atoms that are hydrogen or other atoms that do not form multiple bonds. For example, in the Lewis structures of beryllium dihydride, BeH_2, and boron trifluoride, BF_3, the beryllium and boron atoms each have only four and six electrons, respectively. It is possible to draw a structure with a double bond between a boron atom and a fluorine atom in BF_3, satisfying the octet rule, but experimental evidence indicates the bond lengths are closer to that expected for B–F single bonds. This suggests the best Lewis structure has three B–F single bonds and an electron deficient boron. The reactivity of the compound is also consistent with an electron deficient boron. However, the B–F bonds are slightly shorter than what is actually expected for B–F single bonds, indicating that some double bond character is found in the actual molecule.

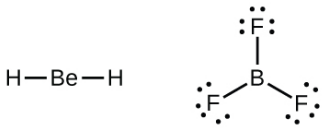

An atom like the boron atom in BF_3, which does not have eight electrons, is very reactive. It readily combines with a molecule containing an atom with a lone pair of electrons. For example, NH_3 reacts with BF_3 because the lone pair on nitrogen can be shared with the boron atom:

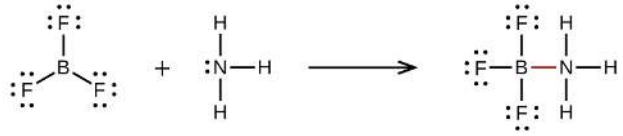

Hypervalent Molecules

Elements in the second period of the periodic table ($n = 2$) can accommodate only eight electrons in their valence shell orbitals because they have only four valence orbitals (one 2*s* and three 2*p* orbitals). Elements in the third and higher periods ($n \geq 3$) have more than four valence orbitals and can share more than four pairs of electrons with other atoms because they have empty *d* orbitals in the same shell. Molecules formed from these elements are sometimes called hypervalent molecules.Table **7.4.5** shows the Lewis structures for two hypervalent molecules, PCl_5 and SF_6.

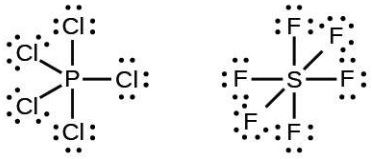

Table **7.4.5**: *In PCl_5, the central atom phosphorus shares five pairs of electrons. In SF_6, sulfur shares six pairs of electrons.*

In some hypervalent molecules, such as IF_5 and XeF_4, some of the electrons in the outer shell of the central atom are lone pairs:

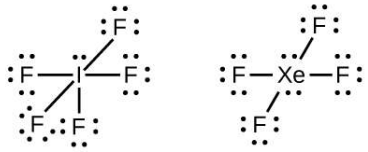

When we write the Lewis structures for these molecules, we find that we have electrons left over after filling the valence shells of the outer atoms with eight electrons. These additional electrons must be assigned to the central atom.

Example 7.4.2: Octet Rule Violations

Xenon is a noble gas, but it forms a number of stable compounds. We examined $\mathbf{XeF_4}$ earlier. What are the Lewis structures of $\mathbf{XeF_2}$ and $\mathbf{XeF_6}$?

Solution

We can draw the Lewis structure of any covalent molecule by following the six steps discussed earlier. In this case, we can condense the last few steps, since not all of them apply.

Step 1: Calculate the number of valence electrons:

$\mathbf{XeF_2}$: $8 + (2 \times 7) = 22$

$\mathbf{XeF_6}$: $8 + (6 \times 7) = 50$

Step 2: Draw a skeleton joining the atoms by single bonds. **Xenon will be the central atom because fluorine cannot be a central atom:**

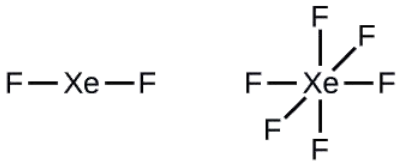

Step 3: Distribute the remaining electrons.

XeF_2: We place three lone pairs of electrons around each F atom, accounting for 12 electrons and giving each F atom 8 electrons. Thus, six electrons (three lone pairs) remain. These lone pairs must be placed on the Xe atom. This is acceptable because Xe atoms

have empty valence shell *d* orbitals and can accommodate more than eight electrons. The Lewis structure of XeF_2 shows two bonding pairs and three lone pairs of electrons around the Xe atom:

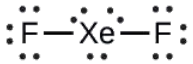

XeF_6: We place three lone pairs of electrons around each F atom, accounting for 36 electrons. Two electrons remain, and this lone pair is placed on the Xe atom:

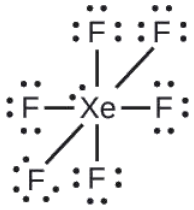

? Exercise 7.4.2: interhalogens

The halogens form a class of compounds called the interhalogens, in which halogen atoms covalently bond to each other. Write the Lewis structures for the interhalogens $\mathbf{BrCl_3}$ and $\mathbf{ICl_4^-}$.

Answer

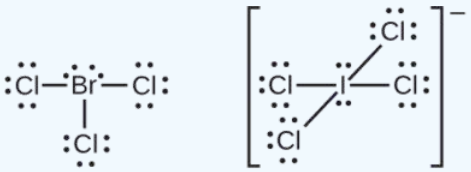

Summary

Valence electronic structures can be visualized by drawing Lewis symbols (for atoms and monatomic ions) and Lewis structures (for molecules and polyatomic ions). Lone pairs, unpaired electrons, and single, double, or triple bonds are used to indicate where the valence electrons are located around each atom in a Lewis structure. Most structures—especially those containing second row elements—obey the octet rule, in which every atom (except H) is surrounded by eight electrons. Exceptions to the octet rule occur for odd-electron molecules (free radicals), electron-deficient molecules, and hypervalent molecules.

Glossary

double bond
covalent bond in which two pairs of electrons are shared between two atoms

free radical
molecule that contains an odd number of electrons

hypervalent molecule
molecule containing at least one main group element that has more than eight electrons in its valence shell

Lewis structure
diagram showing lone pairs and bonding pairs of electrons in a molecule or an ion

Lewis symbol
symbol for an element or monatomic ion that uses a dot to represent each valence electron in the element or ion

lone pair

two (a pair of) valence electrons that are not used to form a covalent bond

octet rule

guideline that states main group atoms will form structures in which eight valence electrons interact with each nucleus, counting bonding electrons as interacting with both atoms connected by the bond

single bond

bond in which a single pair of electrons is shared between two atoms

triple bond

bond in which three pairs of electrons are shared between two atoms

---

This page titled 7.4: Lewis Symbols and Structures is shared under a CC BY license and was authored, remixed, and/or curated by OpenStax.

- **7.4: Lewis Symbols and Structures** by OpenStax is licensed CC BY 4.0. Original source: https://openstax.org/details/books/chemistry-2e.

7.5: Formal Charges and Resonance

Learning Objectives

- Compute formal charges for atoms in any Lewis structure
- Use formal charges to identify the most reasonable Lewis structure for a given molecule
- Explain the concept of resonance and draw Lewis structures representing resonance forms for a given molecule

Previously, we discussed how to write Lewis structures for molecules and polyatomic ions. In some cases, however, there is seemingly more than one valid structure for a molecule. We can use the concept of formal charges to help us predict the most appropriate Lewis structure when more than one is reasonable.

Calculating Formal Charge

The formal charge of an atom in a molecule is the *hypothetical* charge the atom would have if we could redistribute the electrons in the bonds evenly between the atoms. Another way of saying this is that formal charge results when we take the number of valence electrons of a neutral atom, subtract the nonbonding electrons, and then subtract the number of bonds connected to that atom in the Lewis structure.

Thus, we calculate formal charge as follows:

Misplaced '#'

We can double-check formal charge calculations by determining the sum of the formal charges for the whole structure. The sum of the formal charges of all atoms in a molecule must be zero; the sum of the formal charges in an ion should equal the charge of the ion.

We must remember that the formal charge calculated for an atom is not the *actual* charge of the atom in the molecule. Formal charge is only a useful bookkeeping procedure; it does not indicate the presence of actual charges.

Example 7.5.1: Calculating Formal Charge from Lewis Structures

Assign formal charges to each atom in the interhalogen ion ICl_4^-.

Solution

We divide the bonding electron pairs equally for all I–Cl bonds:

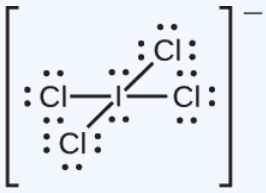

We assign lone pairs of electrons to their atoms. Each Cl atom now has seven electrons assigned to it, and the I atom has eight.

Subtract this number from the number of valence electrons for the neutral atom:

- I: 7 – 8 = –1
- Cl: 7 – 7 = 0

The sum of the formal charges of all the atoms equals –1, which is identical to the charge of the ion (–1).

Exercise 7.5.1

Calculate the formal charge for each atom in the carbon monoxide molecule:

Answer

C −1, O +1

Example 7.5.2: Calculating Formal Charge from Lewis Structures

Assign formal charges to each atom in the interhalogen molecule $\mathbf{BrCl_3}$.

Solution

Assign one of the electrons in each Br–Cl bond to the Br atom and one to the Cl atom in that bond:

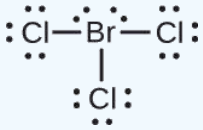

Assign the lone pairs to their atom. Now each Cl atom has seven electrons and the Br atom has seven electrons.

Subtract this number from the number of valence electrons for the neutral atom. This gives the formal charge:

- Br: 7 – 7 = 0
- Cl: 7 – 7 = 0

All atoms in $\mathbf{BrCl_3}$ have a formal charge of zero, and the sum of the formal charges totals zero, as it must in a neutral molecule.

Exercise 7.5.2

Determine the formal charge for each atom in $\mathbf{NCl_3}$.

Answer

N: 0; all three Cl atoms: 0

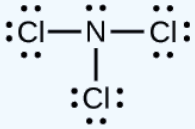

Using Formal Charge to Predict Molecular Structure

The arrangement of atoms in a molecule or ion is called its molecular structure. In many cases, following the steps for writing Lewis structures may lead to more than one possible molecular structure—different multiple bond and lone-pair electron placements or different arrangements of atoms, for instance. A few guidelines involving formal charge can be helpful in deciding which of the possible structures is most likely for a particular molecule or ion.

Predicting Molecular Structure Guidelines

1. A molecular structure in which all formal charges are zero is preferable to one in which some formal charges are not zero.
2. If the Lewis structure must have nonzero formal charges, the arrangement with the smallest nonzero formal charges is preferable.
3. Lewis structures are preferable when adjacent formal charges are zero or of the opposite sign.
4. When we must choose among several Lewis structures with similar distributions of formal charges, the structure with the negative formal charges on the more electronegative atoms is preferable.

To see how these guidelines apply, let us consider some possible structures for carbon dioxide, CO_2. We know from our previous discussion that the less electronegative atom typically occupies the central position, but formal charges allow us to understand *why* this occurs. We can draw three possibilities for the structure: carbon in the center and double bonds, carbon in the center with a single and triple bond, and oxygen in the center with double bonds:

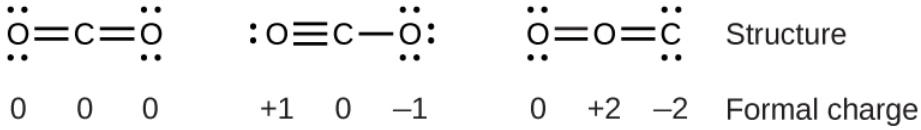

Three Lewis structures are shown. The left and right structures show a carbon atom double bonded to two oxygen atoms, each of which has two lone pairs of electrons. The center structure shows a carbon atom that is triple bonded to an oxygen atom with one lone pair of electrons and single bonded to an oxygen atom with three lone pairs of electrons. The third structure shows an oxygen atom double bonded to another oxygen atom with to lone pairs of electrons. The first oxygen atom is also double bonded to a carbon atom with two lone pairs of electrons.

Comparing the three formal charges, we can definitively identify the structure on the left as preferable because it has only formal charges of zero (Guideline 1).

As another example, the thiocyanate ion, an ion formed from a carbon atom, a nitrogen atom, and a sulfur atom, could have three different molecular structures: CNS^-, NCS^-, or CSN^-. The formal charges present in each of these molecular structures can help us pick the most likely arrangement of atoms. Possible Lewis structures and the formal charges for each of the three possible structures for the thiocyanate ion are shown here:

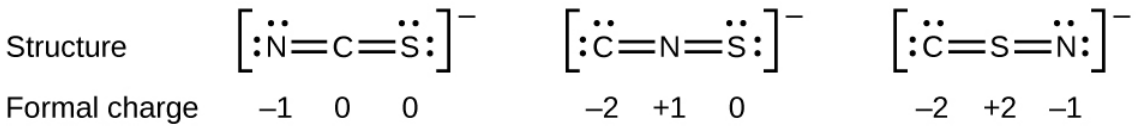

Two rows of structures and numbers are shown. The top row is labeled, “Structure” and depicts three Lewis structures and the bottom row is labeled, “Formal charge.” The left structure shows a carbon atom double bonded to a nitrogen atom with two lone electron pairs on one side and double bonded to a sulfur atom with two lone electron pairs on the other. The structure is surrounded by brackets and has a superscripted negative sign. Below this structure are the numbers negative one, zero, and zero. The middle structure shows a carbon atom with two lone pairs of electrons double bonded to a nitrogen atom that is double bonded to a sulfur atom with two lone electron pairs. The structure is surrounded by brackets and has a superscripted negative sign. Below this structure are the numbers negative two, positive one, and zero. The right structure shows a carbon atom with two lone electron pairs double bonded to a sulfur atom that is double bonded to a nitrogen atom with two lone electron pairs. The structure is surrounded by brackets and has a superscripted negative sign. Below this structure are the numbers negative two, positive two, and one.

Note that the sum of the formal charges in each case is equal to the charge of the ion (–1). However, the first arrangement of atoms is preferred because it has the lowest number of atoms with nonzero formal charges (Guideline 2). Also, it places the least electronegative atom in the center, and the negative charge on the more electronegative element (Guideline 4).

Example 7.5.3: Using Formal Charge to Determine Molecular Structure

Nitrous oxide, N_2O, commonly known as laughing gas, is used as an anesthetic in minor surgeries, such as the routine extraction of wisdom teeth. Which is the likely structure for nitrous oxide?



Solution Determining formal charge yields the following:



The structure with a terminal oxygen atom best satisfies the criteria for the most stable distribution of formal charge:

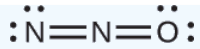

The number of atoms with formal charges are minimized (Guideline 2), and there is no formal charge larger than one (Guideline 2). This is again consistent with the preference for having the less electronegative atom in the central position.

? Exercise 7.5.3

Which is the most likely molecular structure for the nitrite (NO_2^-) ion?

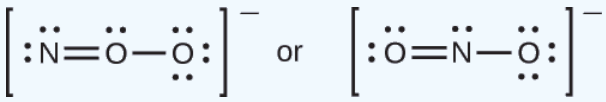

Answer

ONO^-

Resonance

You may have noticed that the nitrite anion in Example **7.5.3** can have two possible structures with the atoms in the same positions. The electrons involved in the N–O double bond, however, are in different positions:

Two Lewis structures are shown. The left structure shows an oxygen atom with three lone pairs of electrons single bonded to a nitrogen atom with one lone pair of electrons that is double bonded to an oxygen with two lone pairs of electrons. Brackets surround this structure, and there is a superscripted negative sign. The right structure shows an oxygen atom with two lone pairs of electrons double bonded to a nitrogen atom with one lone pair of electrons that is single bonded to an oxygen atom with three lone pairs of electrons. Brackets surround this structure, and there is a superscripted negative sign.

If nitrite ions do indeed contain a single and a double bond, we would expect for the two bond lengths to be different. A double bond between two atoms is shorter (and stronger) than a single bond between the same two atoms. Experiments show, however, that both N–O bonds in NO_2^- have the same strength and length, and are identical in all other properties.

It is not possible to write a single Lewis structure for NO_2^- in which nitrogen has an octet and both bonds are equivalent. Instead, we use the concept of resonance: if two or more Lewis structures with the same arrangement of atoms can be written for a molecule or ion, the actual distribution of electrons is an *average* of that shown by the various Lewis structures. The actual distribution of electrons in each of the nitrogen-oxygen bonds in NO_2^- is the average of a double bond and a single bond. We call the individual Lewis structures resonance forms. The actual electronic structure of the molecule (the average of the resonance forms) is called a resonance hybrid of the individual resonance forms. A double-headed arrow between Lewis structures indicates that they are resonance forms. Thus, the electronic structure of the NO_2^- ion is shown as:

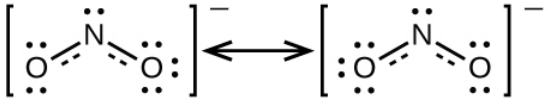

Two Lewis structures are shown with a double headed arrow drawn between them. The left structure shows an oxygen atom with two lone pairs of electrons double bonded to a nitrogen atom with one lone pair of electrons that is single bonded to an oxygen atom with three lone pairs of electrons. Brackets surround this structure, and there is a superscripted negative sign. The right structure shows an oxygen atom with three lone pairs of electrons single bonded to a nitrogen atom with one lone pair of electrons that is double bonded to an oxygen atom with two lone pairs of electrons. Brackets surround this structure, and there is a superscripted negative sign.

We should remember that a molecule described as a resonance hybrid *never* possesses an electronic structure described by either resonance form. It does not fluctuate between resonance forms; rather, the actual electronic structure is *always* the average of that

shown by all resonance forms. George Wheland, one of the pioneers of resonance theory, used a historical analogy to describe the relationship between resonance forms and resonance hybrids. A medieval traveler, having never before seen a rhinoceros, described it as a hybrid of a dragon and a unicorn because it had many properties in common with both. Just as a rhinoceros is neither a dragon sometimes nor a unicorn at other times, a resonance hybrid is neither of its resonance forms at any given time. Like a rhinoceros, it is a real entity that experimental evidence has shown to exist. It has some characteristics in common with its resonance forms, but the resonance forms themselves are convenient, imaginary images (like the unicorn and the dragon).

The carbonate anion, CO_3^{2-}, provides a second example of resonance:

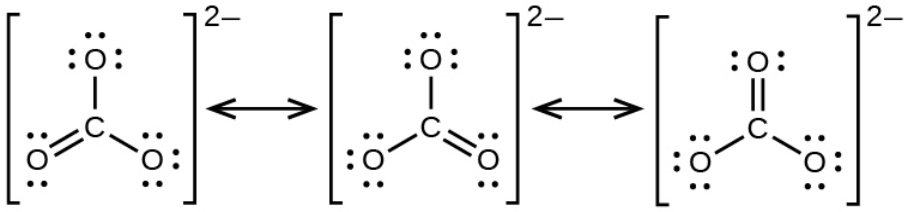

Three Lewis structures are shown with double headed arrows in between. Each structure is surrounded by brackets, and each has a superscripted two negative sign. The left structure depicts a carbon atom bonded to three oxygen atoms. It is single bonded to two of these oxygen atoms, each of which has three lone pairs of electrons, and double bonded to the third, which has two lone pairs of electrons. The double bond is located between the lower left oxygen atom and the carbon atom. The central and right structures are the same as the first, but the position of the double bonded oxygen has moved to the lower right oxygen in the central structure and to the top oxygen in the right structure.

One oxygen atom must have a double bond to carbon to complete the octet on the central atom. All oxygen atoms, however, are equivalent, and the double bond could form from any one of the three atoms. This gives rise to three resonance forms of the carbonate ion. Because we can write three identical resonance structures, we know that the actual arrangement of electrons in the carbonate ion is the average of the three structures. Again, experiments show that all three C–O bonds are exactly the same.

Summary

In a Lewis structure, formal charges can be assigned to each atom by treating each bond as if one-half of the electrons are assigned to each atom. These hypothetical formal charges are a guide to determining the most appropriate Lewis structure. A structure in which the formal charges are as close to zero as possible is preferred. Resonance occurs in cases where two or more Lewis structures with identical arrangements of atoms but different distributions of electrons can be written. The actual distribution of electrons (the resonance hybrid) is an average of the distribution indicated by the individual Lewis structures (the resonance forms).

Key Equations

- Misplaced '#'

Glossary

formal charge

charge that would result on an atom by taking the number of valence electrons on the neutral atom and subtracting the nonbonding electrons and the number of bonds (one-half of the bonding electrons)

molecular structure

arrangement of atoms in a molecule or ion

resonance

situation in which one Lewis structure is insufficient to describe the bonding in a molecule and the average of multiple structures is observed

resonance forms

two or more Lewis structures that have the same arrangement of atoms but different arrangements of electrons

resonance hybrid

average of the resonance forms shown by the individual Lewis structures

---

This page titled 7.5: Formal Charges and Resonance is shared under a CC BY license and was authored, remixed, and/or curated by OpenStax.

- **7.5: Formal Charges and Resonance** by OpenStax is licensed CC BY 4.0. Original source: https://openstax.org/details/books/chemistry-2e.

https://chem.libretexts.org/@go/page/162478

7.6: Molecular Structure and Polarity

Learning Objectives

- Predict the structures of small molecules using valence shell electron pair repulsion (VSEPR) theory
- Explain the concepts of polar covalent bonds and molecular polarity
- Assess the polarity of a molecule based on its bonding and structure

Thus far, we have used two-dimensional Lewis structures to represent molecules. However, molecular structure is actually three-dimensional, and it is important to be able to describe molecular bonds in terms of their distances, angles, and relative arrangements in space (Figure **7.6.1**). A bond angle is the angle between any two bonds that include a common atom, usually measured in degrees. A bond distance (or bond length) is the distance between the nuclei of two bonded atoms along the straight line joining the nuclei. Bond distances are measured in Ångstroms (1 Å = 10^{-10} m) or picometers (1 pm = 10^{-12} m, 100 pm = 1 Å).

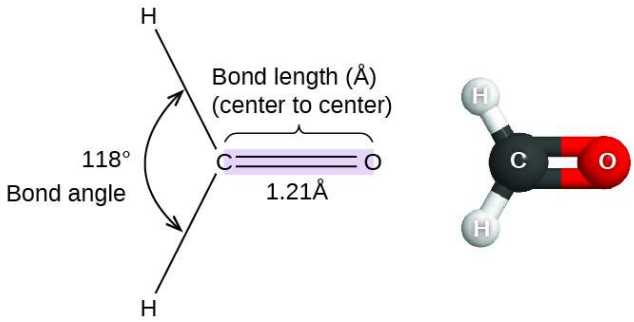

Figure **7.6.1**: Bond distances (lengths) and angles are shown for the formaldehyde molecule, H_2CO.

A pair of images are shown. The left image shows a carbon atom with three atoms bonded in a triangular arrangement around it. There are two hydrogen atoms bonded on the left side of the carbon and the angle between them is labeled, “118 degrees” and, “Bond angle.” The carbon is also double bonded to an oxygen atom. The double bond is shaded and there is a bracket which labels the bond, “Bond length (angstrom), (center to center),” and, “1.21 angstrom.” The right image shows a ball-and-stick model of the same elements. The hydrogen atoms are white, the carbon atom is black, and the oxygen atom is red."

VSEPR Theory

Valence shell electron-pair repulsion theory (VSEPR theory) enables us to predict the molecular structure, including approximate bond angles around a central atom, of a molecule from an examination of the number of bonds and lone electron pairs in its Lewis structure. The VSEPR model assumes that electron pairs in the valence shell of a central atom will adopt an arrangement that minimizes repulsions between these electron pairs by maximizing the distance between them. The electrons in the valence shell of a central atom form either bonding pairs of electrons, located primarily between bonded atoms, or lone pairs. The electrostatic repulsion of these electrons is reduced when the various regions of high electron density assume positions as far from each other as possible.

VSEPR theory predicts the arrangement of electron pairs around each central atom and, usually, the correct arrangement of atoms in a molecule. We should understand, however, that the theory only considers electron-pair repulsions. Other interactions, such as nuclear-nuclear repulsions and nuclear-electron attractions, are also involved in the final arrangement that atoms adopt in a particular molecular structure.

As a simple example of VSEPR theory, let us predict the structure of a gaseous BeF_2 molecule. The Lewis structure of BeF_2 (Figure **7.6.2**) shows only two electron pairs around the central beryllium atom. With two bonds and no lone pairs of electrons on the central atom, the bonds are as far apart as possible, and the electrostatic repulsion between these regions of high electron density is reduced to a minimum when they are on opposite sides of the central atom. The bond angle is 180° (Figure **7.6.2**).

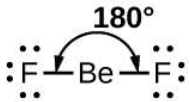

Figure **7.6.2**: The BeF_2 molecule adopts a linear structure in which the two bonds are as far apart as possible, on opposite sides of the Be atom.

A Lewis structure is shown. A fluorine atom with three lone pairs of electrons is single bonded to a beryllium atom which is single bonded to a fluorine atom with three lone pairs of electrons. The angle of the bonds between the two fluorine atoms and the beryllium atom is labeled, “180 degrees.”

Figure **7.6.3** illustrates this and other electron-pair geometries that minimize the repulsions among regions of high electron density (bonds and/or lone pairs). Two regions of electron density around a central atom in a molecule form a linear geometry; three regions form a trigonal planar geometry; four regions form a tetrahedral geometry; five regions form a trigonal bipyramidal geometry; and six regions form an octahedral geometry.

Number of regions	Two regions of high electron density (bonds and/or unshared pairs)	Three regions of high electron density (bonds and/or unshared pairs)	Four regions of high electron density (bonds and/or unshared pairs)	Five regions of high electron density (bonds and/or unshared pairs)	Six regions of high electron density (bonds and/or unshared pairs)
Spatial arrangement	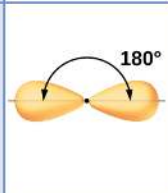	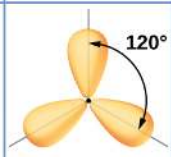	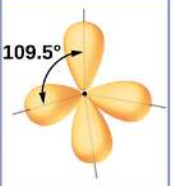	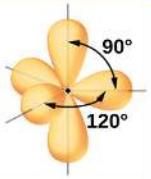	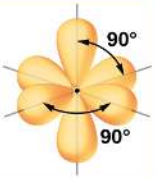
Line-dash-wedge notation	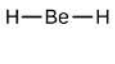	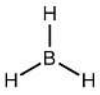	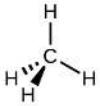	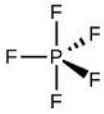	
Electron pair geometry	Linear; 180° angle	Trigonal planar; all angles 120°	Tetrahedral; all angles 109.5°	Trigonal bipyramidal; angles of 90° or 120° An attached atom may be equatorial (in the plane of the triangle) or axial (above or below the plane of the triangle).	Octahedral; all angles 90° or 180°

Figure **7.6.3**: The basic electron-pair geometries predicted by VSEPR theory maximize the space around any region of electron density (bonds or lone pairs).

A table with four rows and six columns is shown. The header column contains the phrases, “Number of regions,” “Spatial arrangement,” “Wedge/dash Notation,” and “Electron pair Geometry.” The first row reads: “Two regions of high electron density (bonds and/or unshared pairs)”, “Three regions of high electron density (bonds and/or unshared pairs),” “Four regions of high electron density (bonds and/or unshared pairs),” “Five regions of high electron density (bonds and/or unshared pairs),” and “Six regions of high electron density (bonds and/or unshared pairs).” The second row shows diagrams of orbitals. The first image shows two oval-shaped orbs with an arrow indicating an angle of 180 degrees. The second image shows three oval-shaped orbs with an arrow indicating an angle of 120 degrees. The third image shows four oval-shaped orbs with an arrow indicating an angle of 109.5 degrees. The fourth image shows five oval-shaped orbs with an arrow indicating an angle of 90 and 120 degrees. The fifth image shows six oval-shaped orbs with an arrow indicating an angle of 90 degrees. The third row contains Lewis structures. The first structure shows a beryllium atom single bonded to two hydrogen atoms. The second structure shows a boron atom single bonded to three hydrogen atoms. The third structure shows a carbon atom single bonded to four hydrogen atoms. The fourth structure shows a phosphorus atom single bonded to five fluorine atoms. The fifth structure shows a sulfur atom single bonded to six fluorine atoms. The fourth row contains the phrases “Linear; 180 degree angle,” Trigonal Planar; all angles 120 degrees,” “Tetrahedral; all angles 109.5 degrees,” “Trigonal bipyramidal; angles of 90 degrees and 120 degrees. An attached atom may be equatorial, (in the plane of the triangle), or axial, (above the plane of the triangle),” and “Octahedral; 90 degrees or 180 degrees.”

Electron-pair Geometry versus Molecular Structure

It is important to note that electron-pair geometry around a central atom is *not* the same thing as its molecular structure. The electron-pair geometries shown in Figure **7.6.3** describe all regions where electrons are located, bonds as well as lone pairs. Molecular structure describes the location of the *atoms*, not the electrons.

We differentiate between these two situations by naming the geometry that includes *all* electron pairs the electron-pair geometry. The structure that includes only the placement of the atoms in the molecule is called the molecular structure. The electron-pair geometries will be the same as the molecular structures when there are no lone electron pairs around the central atom, but they will be different when there are lone pairs present on the central atom.

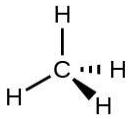

Figure **7.6.4**: The molecular structure of the methane molecule, CH_4, is shown with a tetrahedral arrangement of the hydrogen atoms. VSEPR structures like this one are often drawn using the wedge and dash notation, in which solid lines represent bonds in the plane of the page, solid wedges represent bonds coming up out of the plane, and dashed lines represent bonds going down into the plane.

A Lewis structure shows a carbon atom single bonded to four hydrogen atoms. This structure uses wedges and dashes to give it a three dimensional appearance.

For example, the methane molecule, CH_4, which is the major component of natural gas, has four bonding pairs of electrons around the central carbon atom; the electron-pair geometry is tetrahedral, as is the molecular structure (Figure **7.6.4**). On the other hand, the ammonia molecule, NH_3, also has four electron pairs associated with the nitrogen atom, and thus has a tetrahedral electron-pair geometry. One of these regions, however, is a lone pair, which is not included in the molecular structure, and this lone pair influences the shape of the molecule (Figure **7.6.5**).

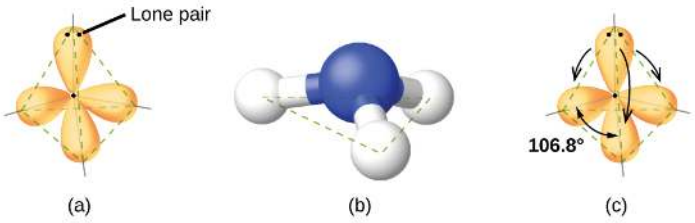

Figure **7.6.5**: (a) The electron-pair geometry for the ammonia molecule is tetrahedral with one lone pair and three single bonds. (b) The trigonal pyramidal molecular structure is determined from the electron-pair geometry. (c) The actual bond angles deviate slightly from the idealized angles because the lone pair takes up a larger region of space than do the single bonds, causing the HNH angle to be slightly smaller than 109.5°.

Three images are shown and labeled, “a,” “b,” and “c.” Image a shows a nitrogen atom single bonded to three hydrogen atoms. There are four oval-shaped orbs that surround each hydrogen and one facing away from the rest of the molecule. These orbs are located in a tetrahedral arrangement. Image b shows a ball-and-stick model of the nitrogen single bonded to the three hydrogen atoms. Image c is the same as image a, but there are four curved, double headed arrows that circle the molecule and are labeled, “106.8 degrees.”

Small distortions from the ideal angles in Figure **7.6.5** can result from differences in repulsion between various regions of electron density. VSEPR theory predicts these distortions by establishing an order of repulsions and an order of the amount of space occupied by different kinds of electron pairs. The order of electron-pair repulsions from greatest to least repulsion is:

lone pair-lone pair > lone pair-bonding pair > bonding pair-bonding pair

This order of repulsions determines the amount of space occupied by different regions of electrons. A lone pair of electrons occupies a larger region of space than the electrons in a triple bond; in turn, electrons in a triple bond occupy more space than those in a double bond, and so on. The order of sizes from largest to smallest is:

lone pair > triple bond > double bond > single bond

Consider formaldehyde, H_2CO, which is used as a preservative for biological and anatomical specimens. This molecule has regions of high electron density that consist of two single bonds and one double bond. The basic geometry is trigonal planar with 120° bond angles, but we see that the double bond causes slightly larger angles (121°), and the angle between the single bonds is slightly smaller (118°).

In the ammonia molecule, the three hydrogen atoms attached to the central nitrogen are not arranged in a flat, trigonal planar molecular structure, but rather in a three-dimensional trigonal pyramid (Figure **7.6.6**) with the nitrogen atom at the apex and the three hydrogen atoms forming the base. The ideal bond angles in a trigonal pyramid are based on the tetrahedral electron pair geometry. Again, there are slight deviations from the ideal because lone pairs occupy larger regions of space than do bonding electrons. The H–N–H bond angles in NH_3 are slightly smaller than the 109.5° angle in a regular tetrahedron (Figure **7.6.6**) because the lone pair-bonding pair repulsion is greater than the bonding pair-bonding pair repulsion. The ideal molecular structures are predicted based on the electron-pair geometries for various combinations of lone pairs and bonding pairs.

Number of electron pairs	Electron pair geometries: 0 lone pair	1 lone pair	2 lone pairs	3 lone pairs	4 lone pairs
2	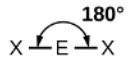 Linear				
3	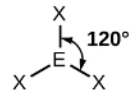 Trigonal planar	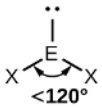 Bent or angular			
4	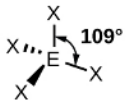 Tetrahedral	Trigonal pyramid	Bent or angular		
5	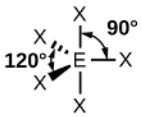 Trigonal bipyramid	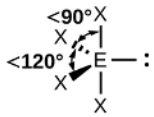 Sawhorse or seesaw	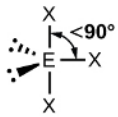 T-shape	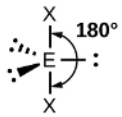 Linear	
6	Octahedral	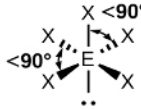 Square pyramid	Square planar	T-shape	Linear

Figure **7.6.6**: The molecular structures are identical to the electron-pair geometries when there are no lone pairs present (first column). For a particular number of electron pairs (row), the molecular structures for one or more lone pairs are determined based on modifications of the corresponding electron-pair geometry.

A table is shown that is comprised of six rows and six columns. The header row reads: “Number of Electron Pairs,” “Electron pair geometries; 0 lone pair,” “1 lone pair,” “2 lone pairs,” “3 lone pairs,” and “4 lone pairs.” The first column contains the numbers 2, 3, 4, 5, and 6. The first space in the second column contains a structure in which the letter E is single bonded to the letter X on each side. The angle of the bonds is labeled with a curved, double headed arrow and the value, “180 degrees.” The structure is labeled, “Linear.” The second space in the second column contains a structure in which the letter E is single bonded to the letter X on three sides. The angle between the bonds is labeled with a curved, double headed arrow and the value, “120 degrees.” The structure is labeled, “Trigonal planar.” The third space in the second column contains a structure in which the letter E is single bonded to the letter X four times. The angle between the bonds is labeled with a curved, double headed arrow and the value, “109 degrees.” The structure is labeled, “Tetrahedral.” The fourth space in the second column contains a structure in which the letter E is single bonded to the letter X on five sides. The angle between the bonds is labeled with a curved, double headed arrow and the values “90 and 120 degrees.” The structure is labeled, “Trigonal bipyramid.” The fifth space in the second column contains a structure in which the letter E is single bonded to the letter X on six sides. The angle between the bonds is labeled with a curved, double headed arrow and the value, “90 degrees.” The structure is labeled, “Octahedral.” The first space in the third column is empty while the second contains a structure in which the letter E is single bonded to the letter X on each side and has a lone pair of electrons. The angle between the bonds is labeled with a curved, double headed arrow and the value, “less than 120 degrees.” The structure is labeled, “Bent or angular.” The third space in the third column contains a structure in which the letter E is single bonded to the letter X three times and to a lone pair of electrons. It is labeled with a curved, double headed arrow and the value, “less than 109 degrees.” The structure is labeled, “Trigonal pyramid.” The fourth space in the third column contains a structure in which the letter E is single bonded to the letter X on four sides and has a lone pair of electrons. The bond angle is labeled with a curved, double headed arrow and the values, “less than 90 and less than 120 degrees.” The structure is labeled, “Sawhorse or seesaw.” The fifth space in the third column contains a structure in which the letter E is single bonded to the letter X on five sides and has a lone pair of electrons. The bond angle is labeled with a curved, double headed arrow and the value, “less than 90 degrees.” The structure is labeled, “Square pyramidal.” The first and second spaces in the fourth column are empty while the third contains a structure in which the letter E is single bonded to the letter X on each side and has two lone pairs of electrons. The bond angle is labeled with a curved, double headed arrow and the value, “less than less than 109 degrees.” The structure is labeled, “Bent or angular.” The fourth space in the fourth column contains a structure in which the letter E is single bonded to the letter X three times and to two lone pairs of electrons. The bond angle is labeled with a curved, double headed arrow and the value, “less than 90 degrees.” The structure is labeled, “T - shape.” The fifth space in the fourth column contains a structure in which the letter E is single bonded to the letter X on four sides and has two lone pairs of electrons. The bond angle is labeled with a curved, double headed arrow and the value “90 degrees.” The structure is labeled, “Square planar.” The first, second and third spaces in the fifth column are empty while the fourth contains a structure in which the letter E is single bonded to the letter X on each side and has three lone pairs of electrons. The bond angle is labeled with a curved, double headed arrow and the value, “180 degrees.” The structure is labeled, “Linear.” The fifth space in the fifth column contains a structure in which the letter E is single bonded to the letter X three times and to three lone pairs of electrons. The bond angle is labeled with a curved, double headed arrow and the value, “less than 90 degrees.” The structure is labeled, “T - shape.” The first, second, third, and fourth spaces in the sixth column are empty while the fifth contains a structure in which the letter E is single bonded to the letter X on each side and has four lone pairs of electrons. The bond angle is labeled with a curved, double headed arrow and the value “180 degrees.” The structure is labeled, “Linear.” All the structures use wedges and dashes to give them three dimensional appearances.

According to VSEPR theory, the terminal atom locations (Xs in Figure **7.6.7**) are equivalent within the linear, trigonal planar, and tetrahedral electron-pair geometries (the first three rows of the table). It does not matter which X is replaced with a lone pair because the molecules can be rotated to convert positions. For trigonal bipyramidal electron-pair geometries, however, there are two distinct X positions (Figure **7.6.7**a): an axial position (if we hold a model of a trigonal bipyramid by the two axial positions, we have an axis around which we can rotate the model) and an equatorial position (three positions form an equator around the middle of the molecule). The axial position is surrounded by bond angles of 90°, whereas the equatorial position has more space available because of the 120° bond angles. In a trigonal bipyramidal electron-pair geometry, lone pairs always occupy equatorial positions because these more spacious positions can more easily accommodate the larger lone pairs.

Theoretically, we can come up with three possible arrangements for the three bonds and two lone pairs for the ClF_3 molecule (Figure **7.6.7**). The stable structure is the one that puts the lone pairs in equatorial locations, giving a T-shaped molecular structure.

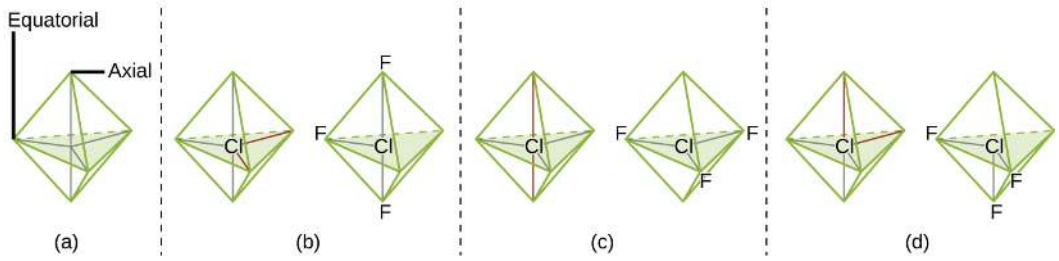

Figure **7.6.7**: (a) In a trigonal bipyramid, the two axial positions are located directly across from one another, whereas the three equatorial positions are located in a triangular arrangement. (b–d) The two lone pairs (red lines) in ClF_3 have several possible arrangements, but the T-shaped molecular structure (b) is the one actually observed, consistent with the larger lone pairs both occupying equatorial positions.

Four sets of images are shown and labeled, “a,” “b,” “c,” and “d.” Each image is separated by a dashed vertical line. Image a shows a six-faced, bi-pyramidal structure where the central vertical axis is labeled, “Axial,” and the horizontal plane is labeled, “Equatorial.” Image b shows a pair of diagrams in the same shape as image a, but in these diagrams, the left has a chlorine atom in the center while the right has a chlorine atom in the center, two fluorine atoms on the upper and lower ends, and one fluorine in the left horizontal position. Image c shows a pair of diagrams in the same shape as image a, but in these diagrams, the left has a chlorine atom in the center while the right has a chlorine atom in the center and three fluorine atoms in each horizontal position. Image d shows a pair of diagrams in the same shape as image a, but in these diagrams, the left has a chlorine atom in the center while the right has a chlorine atom in the center, two fluorine atoms in the horizontal positions, and one in the axial bottom position.

When a central atom has two lone electron pairs and four bonding regions, we have an octahedral electron-pair geometry. The two lone pairs are on opposite sides of the octahedron (180° apart), giving a square planar molecular structure that minimizes lone pair-lone pair repulsions.

Predicting Electron Pair Geometry and Molecular Structure

The following procedure uses VSEPR theory to determine the electron pair geometries and the molecular structures:

1. Write the Lewis structure of the molecule or polyatomic ion.
2. Count the number of regions of electron density (lone pairs and bonds) around the central atom. A single, double, or triple bond counts as one region of electron density.
3. Identify the electron-pair geometry based on the number of regions of electron density: linear, trigonal planar, tetrahedral, trigonal bipyramidal, or octahedral (Figure **7.6.7**, first column).
4. Use the number of lone pairs to determine the molecular structure (Figure **7.6.7**). If more than one arrangement of lone pairs and chemical bonds is possible, choose the one that will minimize repulsions, remembering that lone pairs occupy more space than multiple bonds, which occupy more space than single bonds. In trigonal bipyramidal arrangements, repulsion is minimized when every lone pair is in an equatorial position. In an octahedral arrangement with two lone pairs, repulsion is minimized when the lone pairs are on opposite sides of the central atom.

The following examples illustrate the use of VSEPR theory to predict the molecular structure of molecules or ions that have no lone pairs of electrons. In this case, the molecular structure is identical to the electron pair geometry.

Example **7.6.1**: Predicting Electron-pair Geometry and Molecular Structure

Predict the electron-pair geometry and molecular structure for each of the following:

a. carbon dioxide, CO_2, a molecule produced by the combustion of fossil fuels
b. boron trichloride, BCl_3, an important industrial chemical

Solution

(a) We write the Lewis structure of CO_2 as:

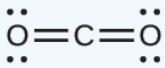

This shows us two regions of high electron density around the carbon atom—each double bond counts as one region, and there are no lone pairs on the carbon atom. Using VSEPR theory, we predict that the two regions of electron density arrange themselves on opposite sides of the central atom with a bond angle of 180°. The electron-pair geometry and molecular structure are identical, and CO_2 molecules are linear.

(b) We write the Lewis structure of BCl_3 as:

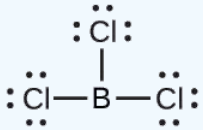

Thus we see that BCl_3 contains three bonds, and there are no lone pairs of electrons on boron. The arrangement of three regions of high electron density gives a trigonal planar electron-pair geometry. The B–Cl bonds lie in a plane with 120° angles between them. BCl_3 also has a trigonal planar molecular structure.

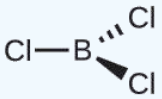

The electron-pair geometry and molecular structure of BCl_3 are both trigonal planar. Note that the VSEPR geometry indicates the correct bond angles (120°), unlike the Lewis structure shown above.

? Exercise 7.6.1

Carbonate, CO_3^{2-}, is a common polyatomic ion found in various materials from eggshells to antacids. What are the electron-pair geometry and molecular structure of this polyatomic ion?

Answer

The electron-pair geometry is trigonal planar and the molecular structure is trigonal planar. Due to resonance, all three C–O bonds are identical. Whether they are single, double, or an average of the two, each bond counts as one region of electron density.

✓ Example 7.6.2: Predicting Electron-pair Geometry and Molecular Structure

Two of the top 50 chemicals produced in the United States, ammonium nitrate and ammonium sulfate, both used as fertilizers, contain the ammonium ion. Predict the electron-pair geometry and molecular structure of the NH_4^+ cation.

Solution

We write the Lewis structure of NH_4^+ as:

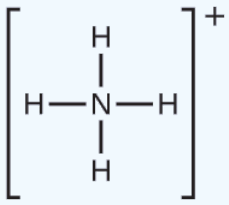

Figure 7.6.7).

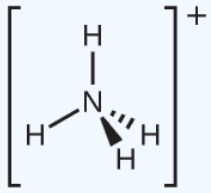

Figure **7.6.8**: *The ammonium ion displays a tetrahedral electron-pair geometry as well as a tetrahedral molecular structure.*

? Exercise 7.6.2

Identify a molecule with trigonal bipyramidal molecular structure.

Answer

Any molecule with five electron pairs around the central atoms including no lone pairs will be trigonal bipyramidal. $\mathbf{PF_5}$ is a common example

The next several examples illustrate the effect of lone pairs of electrons on molecular structure.

✓ Example 7.6.3: Lone Pairs on the Central Atom

Predict the electron-pair geometry and molecular structure of a water molecule.

Solution

The Lewis structure of H_2O indicates that there are four regions of high electron density around the oxygen atom: two lone pairs and two chemical bonds:

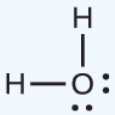

Figure **7.6.9**. Thus, the electron-pair geometry is tetrahedral and the molecular structure is bent with an angle slightly less than 109.5°. In fact, the bond angle is 104.5°.

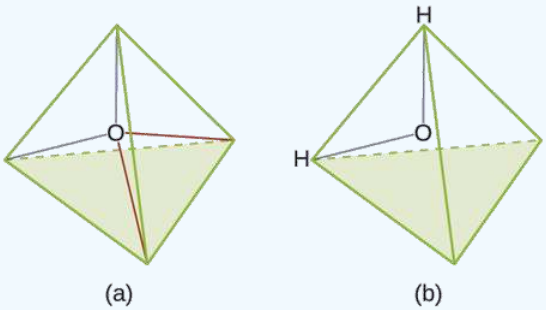

Figure **7.6.9**: (a) H_2O has four regions of electron density around the central atom, so it has a tetrahedral electron-pair geometry. (b) Two of the electron regions are lone pairs, so the molecular structure is bent.

? Exercise 7.6.3

The hydronium ion, H_3O^+, forms when acids are dissolved in water. Predict the electron-pair geometry and molecular structure of this cation.

Answer

electron pair geometry: tetrahedral; molecular structure: trigonal pyramidal

Example 7.6.4: SF_4 Sulfur tetrafluoride,

Predicting Electron-pair Geometry and Molecular Structure: SF_4, is extremely valuable for the preparation of fluorine-containing compounds used as herbicides (i.e., SF_4 is used as a fluorinating agent). Predict the electron-pair geometry and molecular structure of a SF_4 molecule.

Solution

The Lewis structure of SF_4 indicates five regions of electron density around the sulfur atom: one lone pair and four bonding pairs:

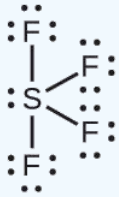

Figure 7.6.10).

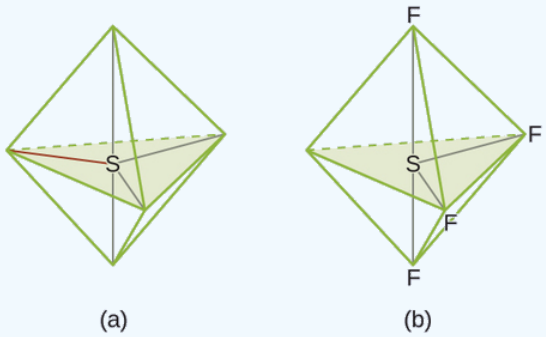

Figure 7.6.10: (a) SF_4 has a trigonal bipyramidal arrangement of the five regions of electron density. (b) One of the regions is a lone pair, which results in a seesaw-shaped molecular structure.

Exercise 7.6.4

Predict the electron pair geometry and molecular structure for molecules of XeF_2.

Answer

The electron-pair geometry is trigonal bipyramidal. The molecular structure is linear.

Example 7.6.4: XeF_4

Of all the noble gases, xenon is the most reactive, frequently reacting with elements such as oxygen and fluorine. Predict the electron-pair geometry and molecular structure of the XeF_4 molecule.

Solution

The Lewis structure of XeF_4 indicates six regions of high electron density around the xenon atom: two lone pairs and four bonds:

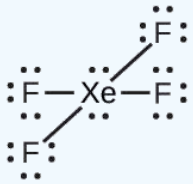

Figure 7.6.11: The five atoms are all in the same plane and have a square planar molecular structure.

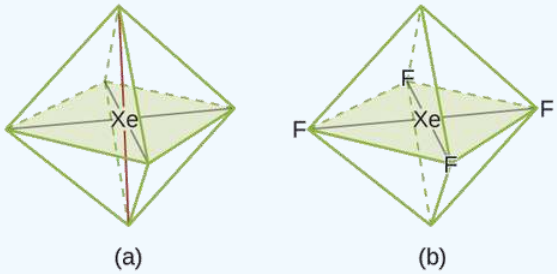

Figure **7.6.11**: (a) XeF_4 adopts an octahedral arrangement with two lone pairs (red lines) and four bonds in the electron-pair geometry. (b) The molecular structure is square planar with the lone pairs directly across from one another.

? Exercise 7.6.4

In a certain molecule, the central atom has three lone pairs and two bonds. What will the electron pair geometry and molecular structure be?

Answer

electron pair geometry: trigonal bipyramidal; molecular structure: linear

Molecular Structure for Multicenter Molecules

When a molecule or polyatomic ion has only one central atom, the molecular structure completely describes the shape of the molecule. Larger molecules do not have a single central atom, but are connected by a chain of interior atoms that each possess a "local" geometry. The way these local structures are oriented with respect to each other also influences the molecular shape, but such considerations are largely beyond the scope of this introductory discussion. For our purposes, we will only focus on determining the local structures.

✓ Example 7.6.5: Predicting Structure in Multicenter Molecules

The Lewis structure for the simplest amino acid, glycine, $H_2NCH_2CO_2H$, is shown here. Predict the local geometry for the nitrogen atom, the two carbon atoms, and the oxygen atom with a hydrogen atom attached:

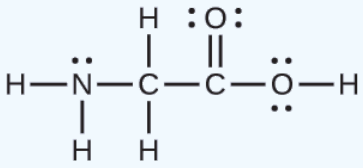

Solution

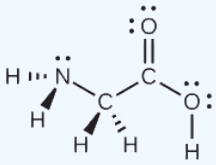

Consider each central atom independently. The electron-pair geometries:

- nitrogen—four regions of electron density; tetrahedral
- carbon ($\underline{C}H_2$)—four regions of electron density; tetrahedral
- carbon ($\underline{C}O_2$)—three regions of electron density; trigonal planar
- oxygen ($\underline{O}H$)—four regions of electron density; tetrahedral

The local structures:

- nitrogen—three bonds, one lone pair; trigonal pyramidal
- carbon ($\underline{C}H_2$)—four bonds, no lone pairs; tetrahedral
- carbon ($\underline{C}O_2$)—three bonds (double bond counts as one bond), no lone pairs; trigonal planar
- oxygen ($\underline{O}H$)—two bonds, two lone pairs; bent (109°)

? Exercise 7.6.5

Another amino acid is alanine, which has the Lewis structure shown here. Predict the electron-pair geometry and local structure of the nitrogen atom, the three carbon atoms, and the oxygen atom with hydrogen attached:

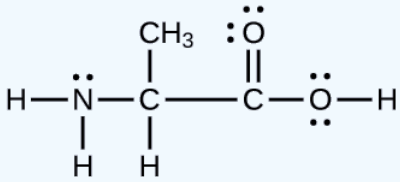

Answer

electron-pair geometries: nitrogen—tetrahedral; carbon ($\underline{C}H$)—tetrahedral; carbon ($\underline{C}H_3$)—tetrahedral; carbon ($\underline{C}O_2$)—trigonal planar; oxygen ($\underline{O}H$)—tetrahedral; local structures: nitrogen—trigonal pyramidal; carbon ($\underline{C}H$)—tetrahedral; carbon ($\underline{C}H_3$)—tetrahedral; carbon ($\underline{C}O_2$)—trigonal planar; oxygen ($\underline{O}H$)—bent (109°)

✓ Example 7.6.6: Molecular Simulation

Using this molecular shape simulator allows us to control whether bond angles and/or lone pairs are displayed by checking or unchecking the boxes under “Options” on the right. We can also use the “Name” checkboxes at bottom-left to display or hide the electron pair geometry (called “electron geometry” in the simulator) and/or molecular structure (called “molecular shape” in the simulator).

Build the molecule HCN in the simulator based on the following Lewis structure:

$$\mathbf{H–C\equiv N}$$

Click on each bond type or lone pair at right to add that group to the central atom. Once you have the complete molecule, rotate it to examine the predicted molecular structure. What molecular structure is this?

Solution

The molecular structure is linear.

? Exercise 7.6.6

Build a more complex molecule in the simulator. Identify the electron-group geometry, molecular structure, and bond angles. Then try to find a chemical formula that would match the structure you have drawn.

Answer

Answers will vary. For example, an atom with four single bonds, a double bond, and a lone pair has an octahedral electron-group geometry and a square pyramidal molecular structure. $XeOF_4$ is a molecule that adopts this structure.

Molecular Polarity and Dipole Moment

As discussed previously, polar covalent bonds connect two atoms with differing electronegativities, leaving one atom with a partial positive charge (δ+) and the other atom with a partial negative charge (δ–), as the electrons are pulled toward the more electronegative atom. This separation of charge gives rise to a bond dipole moment. The magnitude of a bond dipole moment is represented by the Greek letter mu (μ) and is given by

$$\mu = Qr \tag{7.6.1}$$

where

- Q is the magnitude of the partial charges (determined by the electronegativity difference) and
- r is the distance between the charges:

This bond moment can be represented as a vector, a quantity having both direction and magnitude (Figure **7.6.12**). Dipole vectors are shown as arrows pointing along the bond from the less electronegative atom toward the more electronegative atom. A small plus sign is drawn on the less electronegative end to indicate the partially positive end of the bond. The length of the arrow is proportional to the magnitude of the electronegativity difference between the two atoms.

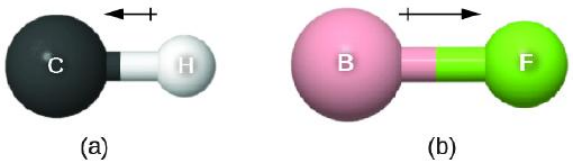

Figure **7.6.12**: (a) There is a small difference in electronegativity between C and H, represented as a short vector. (b) The electronegativity difference between B and F is much larger, so the vector representing the bond moment is much longer.

A whole molecule may also have a separation of charge, depending on its molecular structure and the polarity of each of its bonds. If such a charge separation exists, the molecule is said to be a polar molecule (or dipole); otherwise the molecule is said to be nonpolar. The dipole moment measures the extent of net charge separation in the molecule as a whole. We determine the dipole moment by adding the bond moments in three-dimensional space, taking into account the molecular structure.

For diatomic molecules, there is only one bond, so its bond dipole moment determines the molecular polarity. Homonuclear diatomic molecules such as Br_2 and N_2 have no difference in electronegativity, so their dipole moment is zero. For heteronuclear molecules such as CO, there is a small dipole moment. For HF, there is a larger dipole moment because there is a larger difference in electronegativity.

When a molecule contains more than one bond, the geometry must be taken into account. If the bonds in a molecule are arranged such that their bond moments cancel (vector sum equals zero), then the molecule is nonpolar. This is the situation in CO_2 (Figure **7.6.13*A***). Each of the bonds is polar, but the molecule as a whole is nonpolar. From the Lewis structure, and using VSEPR theory, we determine that the CO_2 molecule is linear with polar C=O bonds on opposite sides of the carbon atom. The bond moments cancel because they are pointed in opposite directions. In the case of the water molecule (Figure **7.6.13*B***), the Lewis structure again shows that there are two bonds to a central atom, and the electronegativity difference again shows that each of these bonds has a nonzero bond moment. In this case, however, the molecular structure is bent because of the lone pairs on O, and the two bond moments do not cancel. Therefore, water does have a net dipole moment and is a polar molecule (dipole).

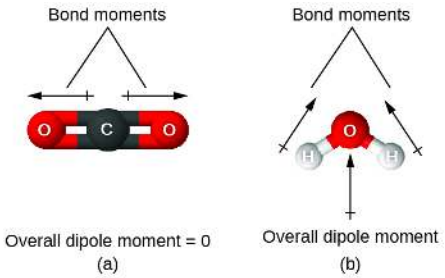

Figure **7.6.13**: The overall dipole moment of a molecule depends on the individual bond dipole moments and how they are arranged. (a) Each CO bond has a bond dipole moment, but they point in opposite directions so that the net CO_2 molecule is nonpolar. (b) In contrast, water is polar because the OH bond moments do not cancel out.

The OCS molecule has a structure similar to CO_2, but a sulfur atom has replaced one of the oxygen atoms. To determine if this molecule is polar, we draw the molecular structure. VSEPR theory predicts a linear molecule:

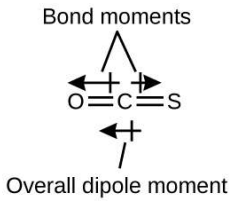

The C–O bond is considerably polar. Although C and S have very similar electronegativity values, S is slightly more electronegative than C, and so the C-S bond is just slightly polar. Because oxygen is more electronegative than sulfur, the oxygen end of the molecule is the negative end.

Chloromethane, CH_3Cl, is another example of a polar molecule. Although the polar C–Cl and C–H bonds are arranged in a tetrahedral geometry, the C–Cl bonds have a larger bond moment than the C–H bond, and the bond moments do not completely cancel each other. All of the dipoles have a upward component in the orientation shown, since carbon is more electronegative than hydrogen and less electronegative than chlorine:

When we examine the highly symmetrical molecules BF_3 (trigonal planar), CH_4 (tetrahedral), PF_5 (trigonal bipyramidal), and SF_6 (octahedral), in which all the polar bonds are identical, the molecules are nonpolar. The bonds in these molecules are arranged such that their dipoles cancel. However, just because a molecule contains identical bonds does not mean that the dipoles will always cancel. Many molecules that have identical bonds and lone pairs on the central atoms have bond dipoles that do not cancel. Examples include H_2S and NH_3. A hydrogen atom is at the positive end and a nitrogen or sulfur atom is at the negative end of the polar bonds in these molecules:

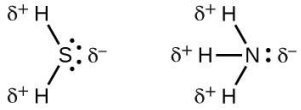

To summarize, to be polar, a molecule must:

1. Contain at least one polar covalent bond.
2. Have a molecular structure such that the sum of the vectors of each bond dipole moment does not cancel.

Properties of Polar Molecules

Polar molecules tend to align when placed in an electric field with the positive end of the molecule oriented toward the negative plate and the negative end toward the positive plate (Figure **7.6.14**). We can use an electrically charged object to attract polar molecules, but nonpolar molecules are not attracted. Also, polar solvents are better at dissolving polar substances, and nonpolar solvents are better at dissolving nonpolar substances.

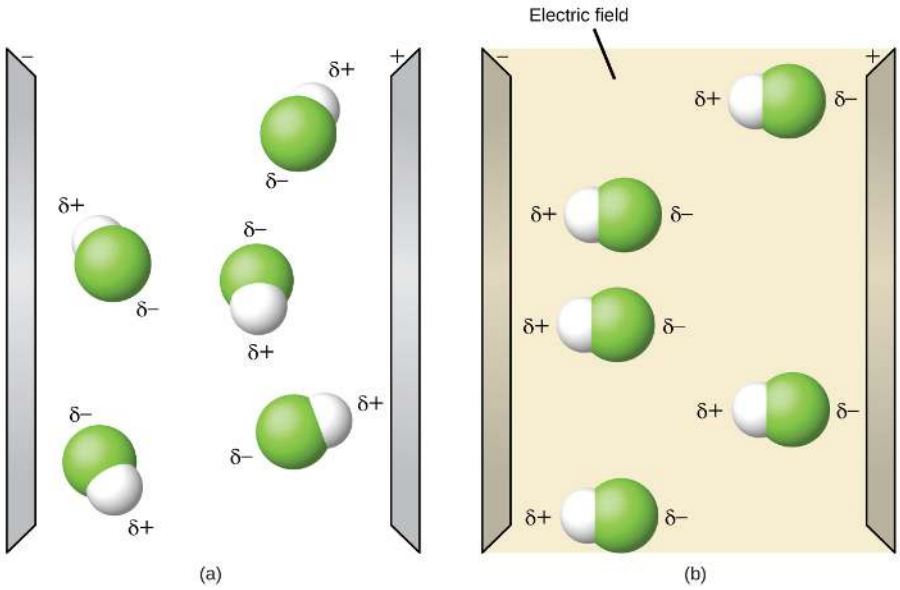

Figure **7.6.14**: (a) Molecules are always randomly distributed in the liquid state in the absence of an electric field. (b) When an electric field is applied, polar molecules like HF will align to the dipoles with the field direction.

Example 7.6.7: Polarity Simulations

Open the molecule polarity simulation and select the "Three Atoms" tab at the top. This should display a molecule ABC with three electronegativity adjustors. You can display or hide the bond moments, molecular dipoles, and partial charges at the right. Turning on the Electric Field will show whether the molecule moves when exposed to a field, similar to Figure **7.6.14**.

Use the electronegativity controls to determine how the molecular dipole will look for the starting bent molecule if:

a. A and C are very electronegative and B is in the middle of the range.
b. A is very electronegative, and B and C are not.

Solution

a. Molecular dipole moment points immediately between A and C.
b. Molecular dipole moment points along the A–B bond, toward A.

Exercise 7.6.7

Determine the partial charges that will give the largest possible bond dipoles.

Answer

The largest bond moments will occur with the largest partial charges. The two solutions above represent how unevenly the electrons are shared in the bond. The bond moments will be maximized when the electronegativity difference is greatest. The controls for A and C should be set to one extreme, and B should be set to the opposite extreme. Although the magnitude of the bond moment will not change based on whether B is the most electronegative or the least, the direction of the bond moment will.

Summary

VSEPR theory predicts the three-dimensional arrangement of atoms in a molecule. It states that valence electrons will assume an electron-pair geometry that minimizes repulsions between areas of high electron density (bonds and/or lone pairs). Molecular structure, which refers only to the placement of atoms in a molecule and not the electrons, is equivalent to electron-pair geometry only when there are no lone electron pairs around the central atom. A dipole moment measures a separation of charge. For one

bond, the bond dipole moment is determined by the difference in electronegativity between the two atoms. For a molecule, the overall dipole moment is determined by both the individual bond moments and how these dipoles are arranged in the molecular structure. Polar molecules (those with an appreciable dipole moment) interact with electric fields, whereas nonpolar molecules do not.

Glossary

axial position
location in a trigonal bipyramidal geometry in which there is another atom at a 180° angle and the equatorial positions are at a 90° angle

bond angle
angle between any two covalent bonds that share a common atom

bond distance
(also, bond length) distance between the nuclei of two bonded atoms

bond dipole moment
separation of charge in a bond that depends on the difference in electronegativity and the bond distance represented by partial charges or a vector

dipole moment
property of a molecule that describes the separation of charge determined by the sum of the individual bond moments based on the molecular structure

electron-pair geometry
arrangement around a central atom of all regions of electron density (bonds, lone pairs, or unpaired electrons)

equatorial position
one of the three positions in a trigonal bipyramidal geometry with 120° angles between them; the axial positions are located at a 90° angle

linear
shape in which two outside groups are placed on opposite sides of a central atom

molecular structure
structure that includes only the placement of the atoms in the molecule

octahedral
shape in which six outside groups are placed around a central atom such that a three-dimensional shape is generated with four groups forming a square and the other two forming the apex of two pyramids, one above and one below the square plane

polar molecule
(also, dipole) molecule with an overall dipole moment

tetrahedral
shape in which four outside groups are placed around a central atom such that a three-dimensional shape is generated with four corners and 109.5° angles between each pair and the central atom

trigonal bipyramidal
shape in which five outside groups are placed around a central atom such that three form a flat triangle with 120° angles between each pair and the central atom, and the other two form the apex of two pyramids, one above and one below the triangular plane

trigonal planar

shape in which three outside groups are placed in a flat triangle around a central atom with 120° angles between each pair and the central atom

valence shell electron-pair repulsion theory (VSEPR)

theory used to predict the bond angles in a molecule based on positioning regions of high electron density as far apart as possible to minimize electrostatic repulsion

vector

quantity having magnitude and direction

This page titled 7.6: Molecular Structure and Polarity is shared under a CC BY license and was authored, remixed, and/or curated by OpenStax.

- **7.7: Molecular Structure and Polarity** by OpenStax is licensed CC BY 4.0. Original source: https://openstax.org/details/books/chemistry-2e.

7.7: Chemical Bonding and Molecular Geometry (Exercises)

7.1: Ionic Bonding

Q7.1.1

Does a cation gain protons to form a positive charge or does it lose electrons?

S7.1.1

The protons in the nucleus do not change during normal chemical reactions. Only the outer electrons move. Positive charges form when electrons are lost.

Q7.1.2

Iron(III) sulfate [$Fe_2(SO_4)_3$] is composed of Fe^{3+} and SO_4^{2-} ions. Explain why a sample of iron(III) sulfate is uncharged.

Q7.1.3

Which of the following atoms would be expected to form negative ions in binary ionic compounds and which would be expected to form positive ions: P, I, Mg, Cl, In, Cs, O, Pb, Co?

S7.1.3

P, I, Cl, and O would form anions because they are nonmetals. Mg, In, Cs, Pb, and Co would form cations because they are metals.

Q7.1.4

Which of the following atoms would be expected to form negative ions in binary ionic compounds and which would be expected to form positive ions: Br, Ca, Na, N, F, Al, Sn, S, Cd?

Q7.1.5

Predict the charge on the monatomic ions formed from the following atoms in binary ionic compounds:

a. P
b. Mg
c. Al
d. O
e. Cl
f. Cs

S7.1.5

P^{3-}; Mg^{2+}; Al^{3+}; O^{2-}; Cl^{-}; Cs^{+}

Q7.1.6

Predict the charge on the monatomic ions formed from the following atoms in binary ionic compounds:

1. I
2. Sr
3. K
4. N
5. S
6. In

S7.1.6

1. I^{-}
2. Sr^{2+}
3. K^{+}
4. N^{3-}

5. S^{2-}
6. In^{3+}

Q7.1.7

Write the electron configuration for each of the following ions:

1. As^{3-}
2. I^{-}
3. Be^{2+}
4. Cd^{2+}
5. O^{2-}
6. Ga^{3+}
7. Li^{+}
8. (h) N^{3-}
9. (i) Sn^{2+}
10. (j) Co^{2+}
11. (k) Fe^{2+}
12. (l) As^{3+}

S7.1.7

$[Ar]4s^2 3d^{10} 4p^6$; $[Kr]4d^{10} 5s^2 5p^6$ $1s^2$ $[Kr]4d^{10}$; $[He]2s^2 2p^6$; $[Ar]3d^{10}$; $1s^2$ (h) $[He]2s^2 2p^6$ (i) $[Kr]4d^{10} 5s^2$ (j) $[Ar]3d^7$ (k) $[Ar]3d^6$, (l) $[Ar]3d^{10} 4s^2$

Q7.1.8

Write the electron configuration for the monatomic ions formed from the following elements (which form the greatest concentration of monatomic ions in seawater):

1. Cl
2. Na
3. Mg
4. Ca
5. K
6. Br
7. Sr
8. (h) F

Q7.1.9

Write out the full electron configuration for each of the following atoms and for the monatomic ion found in binary ionic compounds containing the element:

a. Al
b. Br
c. Sr
d. Li
e. As
f. S

S7.1.9

$1s^2 2s^2 2p^6 3s^2 3p^1$; Al^{3+}: $1s^2 2s^2 2p^6$; $1s^2 2s^2 2p^6 3s^2 3p^6 3d^{10} 4s^2 4p^5$; $1s^2 2s^2 2p^6 3s^2 3p^6 3d^{10} 4s^2 4p^6$; $1s^2 2s^2 2p^6 3s^2 3p^6 3d^{10} 4s^2 4p^6 5s^2$;

Sr^{2+}: $1s^2 2s^2 2p^6 3s^2 3p^6 3d^{10} 4s^2 4p^6$; $1s^2 2s^1$;

Li^{+}: $1s^2$; $1s^2 2s^2 2p^6 3s^2 3p^6 3d^{10} 4s^2 4p^3$; $1s^2 2s^2 2p^6 3s^2 3p^6 3d^{10} 4s^2 4p^6$; $1s^2 2s^2 2p^6 3s^2 3p^4$; $1s^2 2s^2 2p^6 3s^2 3p^6$

Q7.1.10

From the labels of several commercial products, prepare a list of six ionic compounds in the products. For each compound, write the formula. (You may need to look up some formulas in a suitable reference.)

7.3: Covalent Bonding

Why is it incorrect to speak of a molecule of solid NaCl?

NaCl consists of discrete ions arranged in a crystal lattice, not covalently bonded molecules.

What information can you use to predict whether a bond between two atoms is covalent or ionic?

Predict which of the following compounds are ionic and which are covalent, based on the location of their constituent atoms in the periodic table:

1. Cl_2CO
2. MnO
3. NCl_3
4. $CoBr_2$
5. K_2S
6. CO
7. CaF_2
8. (h) HI
9. (i) CaO
10. (j) IBr
11. (k) CO_2

ionic: (b), (d), (e), (g), and (i); covalent: (a), (c), (f), (h), (j), and (k)

Explain the difference between a nonpolar covalent bond, a polar covalent bond, and an ionic bond.

From its position in the periodic table, determine which atom in each pair is more electronegative:

1. Br or Cl
2. N or O
3. S or O
4. P or S
5. Si or N
6. Ba or P
7. N or K

Cl; O; O; S; N; P; N

From its position in the periodic table, determine which atom in each pair is more electronegative:

1. N or P
2. N or Ge
3. S or F
4. Cl or S
5. H or C
6. Se or P
7. C or Si

From their positions in the periodic table, arrange the atoms in each of the following series in order of increasing electronegativity:

1. C, F, H, N, O
2. Br, Cl, F, H, I
3. F, H, O, P, S
4. Al, H, Na, O, P

5. Ba, H, N, O, As

H, C, N, O, F; H, I, Br, Cl, F; H, P, S, O, F; Na, Al, H, P, O; Ba, H, As, N, O

From their positions in the periodic table, arrange the atoms in each of the following series in order of increasing electronegativity:

1. As, H, N, P, Sb
2. Cl, H, P, S, Si
3. Br, Cl, Ge, H, Sr
4. Ca, H, K, N, Si
5. Cl, Cs, Ge, H, Sr

Which atoms can bond to sulfur so as to produce a positive partial charge on the sulfur atom?

N, O, F, and Cl

Which is the most polar bond?

1. C–C
2. C–H
3. N–H
4. O–H
5. Se–H

Identify the more polar bond in each of the following pairs of bonds:

1. HF or HCl
2. NO or CO
3. SH or OH
4. PCl or SCl
5. CH or NH
6. SO or PO
7. CN or NN

HF; CO; OH; PCl; NH; PO; CN

Which of the following molecules or ions contain polar bonds?

1. O_3
2. S_8
3. $\mathbf{O_2^{2-}}$
4. $\mathbf{NO_3^-}$
5. CO_2
6. H_2S
7. $\mathbf{BH_4^-}$

7.4: Lewis Symbols and Structures

Q7.4.1

Write the Lewis symbols for each of the following ions:

a. As^{3-}
b. I^-
c. Be^{2+}
d. O^{2-}
e. Ga^{3+}
f. Li^+
g. N^{3-}

S7.4.1

eight electrons:

eight electrons:

no electrons

Be^{2+};

eight electrons:

no electrons

Ga^{3+};

no electrons

Li^{+};

eight electrons:

Q7.4.2

Many monatomic ions are found in seawater, including the ions formed from the following list of elements. Write the Lewis symbols for the monatomic ions formed from the following elements:

a. Cl
b. Na
c. Mg
d. Ca
e. K
f. Br
g. Sr
h. F

Q7.4.3

Write the Lewis symbols of the ions in each of the following ionic compounds and the Lewis symbols of the atom from which they are formed:

1. MgS
2. Al_2O_3
3. $GaCl_3$
4. K_2O
5. Li_3N
6. KF

(a)

(b)

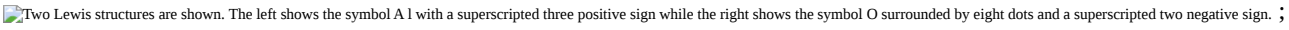

(c)

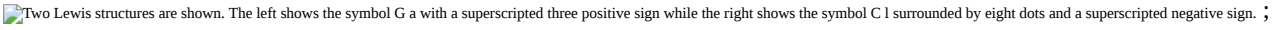

(d)

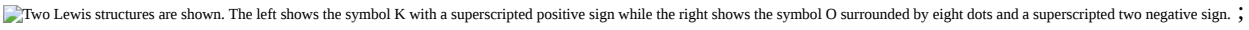

(e)

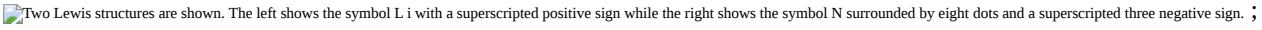

(f)

In the Lewis structures listed here, M and X represent various elements in the third period of the periodic table. Write the formula of each compound using the chemical symbols of each element:

(a)

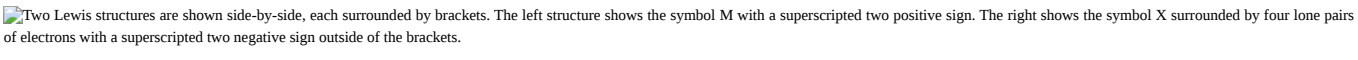

(b)

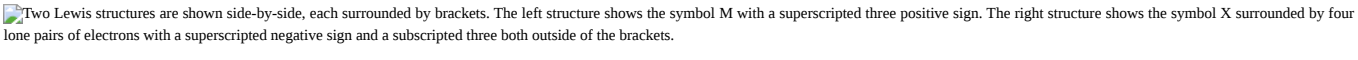

(c)

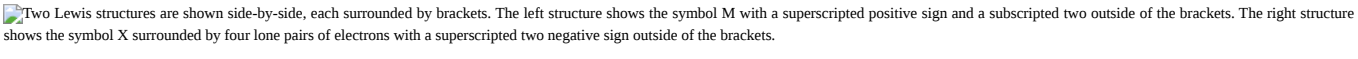

(d)

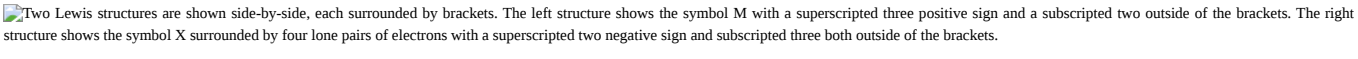

Write the Lewis structure for the diatomic molecule P_2, an unstable form of phosphorus found in high-temperature phosphorus vapor.

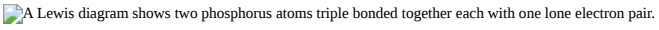

Write Lewis structures for the following:

a. H_2
b. HBr
c. PCl_3
d. SF_2
e. H_2CCH_2
f. HNNH
g. H_2CNH
h. (h) NO^-
i. (i) N_2
j. (j) CO
k. (k) CN^-

Write Lewis structures for the following:

a. O_2
b. H_2CO

c. AsF_3
d. ClNO
e. $SiCl_4$
f. H_3O^+
g. NH_4^+
h. (h) BF_4^-
i. (i) HCCH
j. (j) ClCN
k. (k) C_2^{2+}

(a)

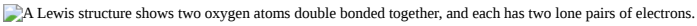

In this case, the Lewis structure is inadequate to depict the fact that experimental studies have shown two unpaired electrons in each oxygen molecule.

(b)

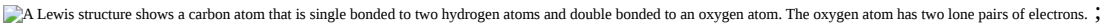

;

(c)

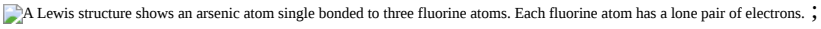

;

(d)

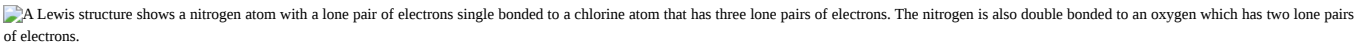

;

(e)

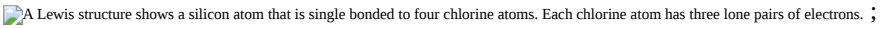

;

(f)

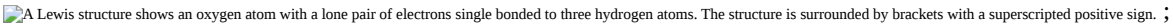

;

(g)

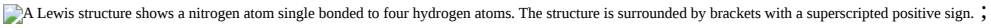

;

(h)

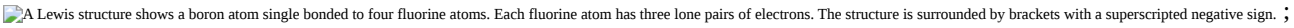

;

(i)

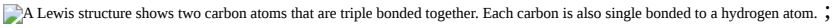

;

(j)

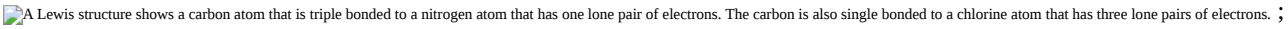

;

(k)

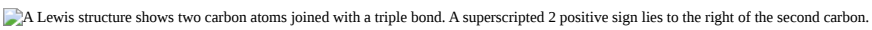

Write Lewis structures for the following:

1. ClF_3
2. PCl_5
3. BF_3
4. PF_6^-

Write Lewis structures for the following:

1. SeF_6
2. XeF_4
3. $\mathbf{SeCl_3^+}$
4. Cl_2BBCl_2 (contains a B–B bond)

SeF_6:

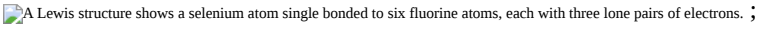
A Lewis structure shows a selenium atom single bonded to six fluorine atoms, each with three lone pairs of electrons. ;

XeF_4:

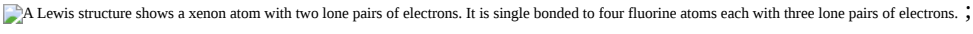
A Lewis structure shows a xenon atom with two lone pairs of electrons. It is single bonded to four fluorine atoms each with three lone pairs of electrons. ;

$\mathbf{SeCl_3^+}$:

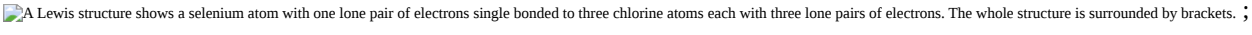
A Lewis structure shows a selenium atom with one lone pair of electrons single bonded to three chlorine atoms each with three lone pairs of electrons. The whole structure is surrounded by brackets. ;

Cl_2BBCl_2:

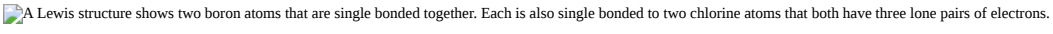
A Lewis structure shows two boron atoms that are single bonded together. Each is also single bonded to two chlorine atoms that both have three lone pairs of electrons.

Write Lewis structures for:

1. $\mathbf{PO_4^{3-}}$
2. $\mathbf{ICl_4^-}$
3. $\mathbf{SO_3^{2-}}$
4. HONO

Correct the following statement: “The bonds in solid $PbCl_2$ are ionic; the bond in a HCl molecule is covalent. Thus, all of the valence electrons in $PbCl_2$ are located on the Cl^- ions, and all of the valence electrons in a HCl molecule are shared between the H and Cl atoms.”

Two valence electrons per Pb atom are transferred to Cl atoms; the resulting Pb^{2+} ion has a $6s^2$ valence shell configuration. Two of the valence electrons in the HCl molecule are shared, and the other six are located on the Cl atom as lone pairs of electrons.

Write Lewis structures for the following molecules or ions:

1. SbH_3
2. XeF_2
3. Se_8 (a cyclic molecule with a ring of eight Se atoms)

Methanol, H_3COH, is used as the fuel in some race cars. Ethanol, C_2H_5OH, is used extensively as motor fuel in Brazil. Both methanol and ethanol produce CO_2 and H_2O when they burn. Write the chemical equations for these combustion reactions using Lewis structures instead of chemical formulas.

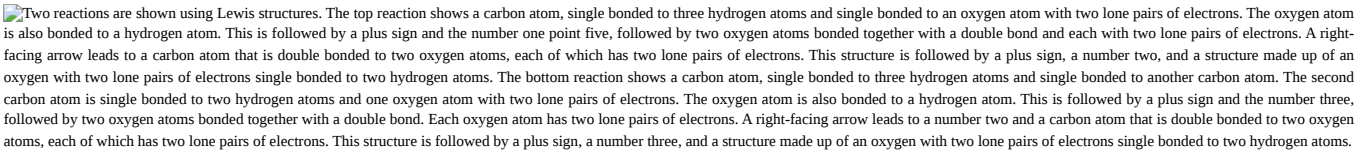
Two reactions are shown using Lewis structures. The top reaction shows a carbon atom, single bonded to three hydrogen atoms and single bonded to an oxygen atom with two lone pairs of electrons. The oxygen atom is also bonded to a hydrogen atom. This is followed by a plus sign and the number one point five, followed by two oxygen atoms bonded together with a double bond and each with two lone pairs of electrons. A right-facing arrow leads to a carbon atom that is double bonded to two oxygen atoms, each of which has two lone pairs of electrons. This structure is followed by a plus sign, a number two, and a structure made up of an oxygen with two lone pairs of electrons single bonded to two hydrogen atoms. The bottom reaction shows a carbon atom, single bonded to three hydrogen atoms and single bonded to another carbon atom. The second carbon atom is single bonded to two hydrogen atoms and one oxygen atom with two lone pairs of electrons. The oxygen atom is also bonded to a hydrogen atom. This is followed by a plus sign and the number three, followed by two oxygen atoms bonded together with a double bond. Each oxygen atom has two lone pairs of electrons. A right-facing arrow leads to a number two and a carbon atom that is double bonded to two oxygen atoms, each of which has two lone pairs of electrons. This structure is followed by a plus sign, a number three, and a structure made up of an oxygen with two lone pairs of electrons single bonded to two hydrogen atoms.

Many planets in our solar system contain organic chemicals including methane (CH_4) and traces of ethylene (C_2H_4), ethane (C_2H_6), propyne (H_3CCCH), and diacetylene (HCCCCH). Write the Lewis structures for each of these molecules.

Carbon tetrachloride was formerly used in fire extinguishers for electrical fires. It is no longer used for this purpose because of the formation of the toxic gas phosgene, Cl_2CO. Write the Lewis structures for carbon tetrachloride and phosgene.

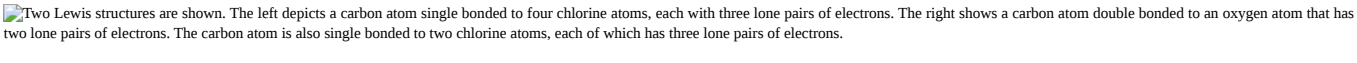
Two Lewis structures are shown. The left depicts a carbon atom single bonded to four chlorine atoms, each with three lone pairs of electrons. The right shows a carbon atom double bonded to an oxygen atom that has two lone pairs of electrons. The carbon atom is also single bonded to two chlorine atoms, each of which has three lone pairs of electrons.

Identify the atoms that correspond to each of the following electron configurations. Then, write the Lewis symbol for the common ion formed from each atom:

1. $1s^2 2s^2 2p^5$
2. $1s^2 2s^2 2p^6 3s^2$

3. $1s^2 2s^2 2p^6 3s^2 3p^6 4s^2 3d^{10}$
4. $1s^2 2s^2 2p^6 3s^2 3p^6 4s^2 3d^{10} 4p^4$
5. $1s^2 2s^2 2p^6 3s^2 3p^6 4s^2 3d^{10} 4p^1$

The arrangement of atoms in several biologically important molecules is given here. Complete the Lewis structures of these molecules by adding multiple bonds and lone pairs. Do not add any more atoms.

the amino acid serine:

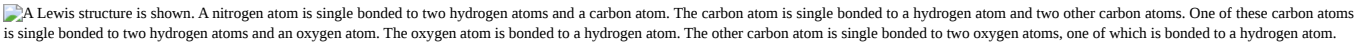
A Lewis structure is shown. A nitrogen atom is single bonded to two hydrogen atoms and a carbon atom. The carbon atom is single bonded to a hydrogen atom and two other carbon atoms. One of these carbon atoms is single bonded to two hydrogen atoms and an oxygen atom. The oxygen atom is bonded to a hydrogen atom. The other carbon atom is single bonded to two oxygen atoms, one of which is bonded to a hydrogen atom.

urea:

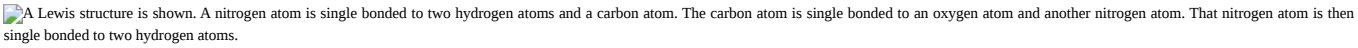
A Lewis structure is shown. A nitrogen atom is single bonded to two hydrogen atoms and a carbon atom. The carbon atom is single bonded to an oxygen atom and another nitrogen atom. That nitrogen atom is then single bonded to two hydrogen atoms.

pyruvic acid:

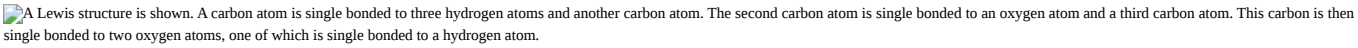
A Lewis structure is shown. A carbon atom is single bonded to three hydrogen atoms and another carbon atom. The second carbon atom is single bonded to an oxygen atom and a third carbon atom. This carbon is then single bonded to two oxygen atoms, one of which is single bonded to a hydrogen atom.

uracil:

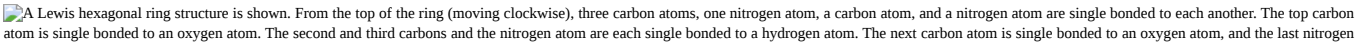
A Lewis hexagonal ring structure is shown. From the top of the ring (moving clockwise), three carbon atoms, one nitrogen atom, a carbon atom, and a nitrogen atom are single bonded to each another. The top carbon atom is single bonded to an oxygen atom. The second and third carbons and the nitrogen atom are each single bonded to a hydrogen atom. The next carbon atom is single bonded to an oxygen atom, and the last nitrogen atom is single bonded to a hydrogen atom.

carbonic acid:

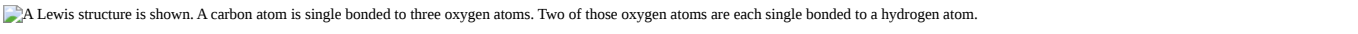
A Lewis structure is shown. A carbon atom is single bonded to three oxygen atoms. Two of those oxygen atoms are each single bonded to a hydrogen atom.

(a)

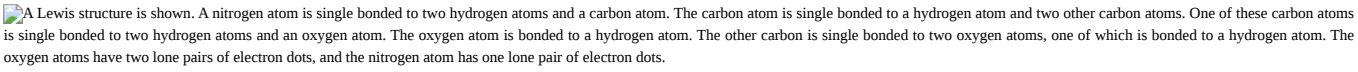
A Lewis structure is shown. A nitrogen atom is single bonded to two hydrogen atoms and a carbon atom. The carbon atom is single bonded to a hydrogen atom and two other carbon atoms. One of these carbon atoms is single bonded to two hydrogen atoms and an oxygen atom. The oxygen atom is bonded to a hydrogen atom. The other carbon is single bonded to two oxygen atoms, one of which is bonded to a hydrogen atom. The oxygen atoms have two lone pairs of electron dots, and the nitrogen atom has one lone pair of electron dots.

;

(b)

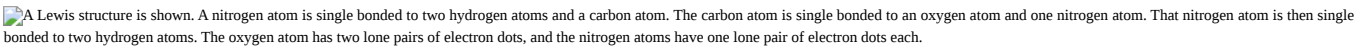
A Lewis structure is shown. A nitrogen atom is single bonded to two hydrogen atoms and a carbon atom. The carbon atom is single bonded to an oxygen atom and one nitrogen atom. That nitrogen atom is then single bonded to two hydrogen atoms. The oxygen atom has two lone pairs of electron dots, and the nitrogen atoms have one lone pair of electron dots each.

;

(c)

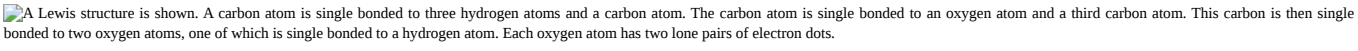
A Lewis structure is shown. A carbon atom is single bonded to three hydrogen atoms and a carbon atom. The carbon atom is single bonded to an oxygen atom and a third carbon atom. This carbon is then single bonded to two oxygen atoms, one of which is single bonded to a hydrogen atom. Each oxygen atom has two lone pairs of electron dots.

;

(d)

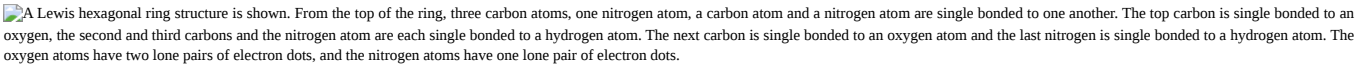
A Lewis hexagonal ring structure is shown. From the top of the ring, three carbon atoms, one nitrogen atom, a carbon atom and a nitrogen atom are single bonded to one another. The top carbon is single bonded to an oxygen, the second and third carbons and the nitrogen atom are each single bonded to a hydrogen atom. The next carbon is single bonded to an oxygen atom and the last nitrogen is single bonded to a hydrogen atom. The oxygen atoms have two lone pairs of electron dots, and the nitrogen atoms have one lone pair of electron dots.

;

(e)

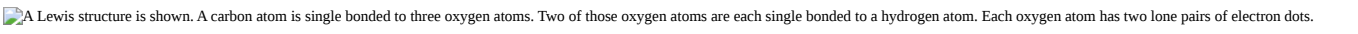
A Lewis structure is shown. A carbon atom is single bonded to three oxygen atoms. Two of those oxygen atoms are each single bonded to a hydrogen atom. Each oxygen atom has two lone pairs of electron dots.

A compound with a molar mass of about 28 g/mol contains 85.7% carbon and 14.3% hydrogen by mass. Write the Lewis structure for a molecule of the compound.

A compound with a molar mass of about 42 g/mol contains 85.7% carbon and 14.3% hydrogen by mass. Write the Lewis structure for a molecule of the compound.

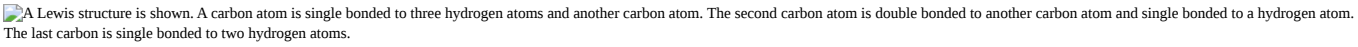
A Lewis structure is shown. A carbon atom is single bonded to three hydrogen atoms and another carbon atom. The second carbon atom is double bonded to another carbon atom and single bonded to a hydrogen atom. The last carbon is single bonded to two hydrogen atoms.

Two arrangements of atoms are possible for a compound with a molar mass of about 45 g/mol that contains 52.2% C, 13.1% H, and 34.7% O by mass. Write the Lewis structures for the two molecules.

How are single, double, and triple bonds similar? How do they differ?

Each bond includes a sharing of electrons between atoms. Two electrons are shared in a single bond; four electrons are shared in a double bond; and six electrons are shared in a triple bond.

7.5: Formal Charges and Resonance

Write resonance forms that describe the distribution of electrons in each of these molecules or ions.

1. selenium dioxide, OSeO
2. nitrate ion, $\mathbf{NO_3^-}$
3. nitric acid, HNO_3 (N is bonded to an OH group and two O atoms)
4. benzene, C_6H_6:

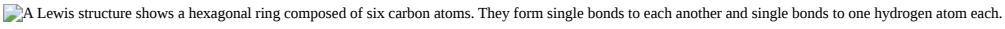
A Lewis structure shows a hexagonal ring composed of six carbon atoms. They form single bonds to each another and single bonds to one hydrogen atom each.

the formate ion:

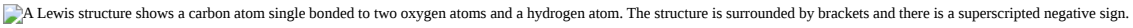
A Lewis structure shows a carbon atom single bonded to two oxygen atoms and a hydrogen atom. The structure is surrounded by brackets and there is a superscripted negative sign.

Write resonance forms that describe the distribution of electrons in each of these molecules or ions.

1. sulfur dioxide, SO_2
2. carbonate ion, $\mathbf{CO_3^{2-}}$
3. hydrogen carbonate ion, $\mathbf{HCO_3^-}$ (C is bonded to an OH group and two O atoms)
4. pyridine:

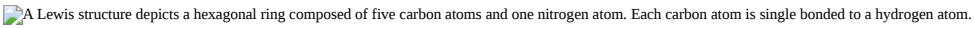
A Lewis structure depicts a hexagonal ring composed of five carbon atoms and one nitrogen atom. Each carbon atom is single bonded to a hydrogen atom.

the allyl ion:

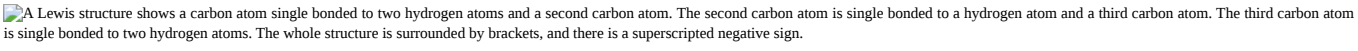
A Lewis structure shows a carbon atom single bonded to two hydrogen atoms and a second carbon atom. The second carbon atom is single bonded to a hydrogen atom and a third carbon atom. The third carbon atom is single bonded to two hydrogen atoms. The whole structure is surrounded by brackets, and there is a superscripted negative sign.

(a)

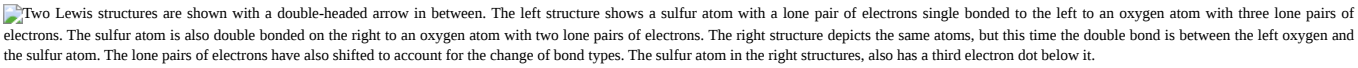
Two Lewis structures are shown with a double-headed arrow in between. The left structure shows a sulfur atom with a lone pair of electrons single bonded to the left to an oxygen atom with three lone pairs of electrons. The sulfur atom is also double bonded on the right to an oxygen atom with two lone pairs of electrons. The right structure depicts the same atoms, but this time the double bond is between the left oxygen and the sulfur atom. The lone pairs of electrons have also shifted to account for the change of bond types. The sulfur atom in the right structures, also has a third electron dot below it.

;

(b)

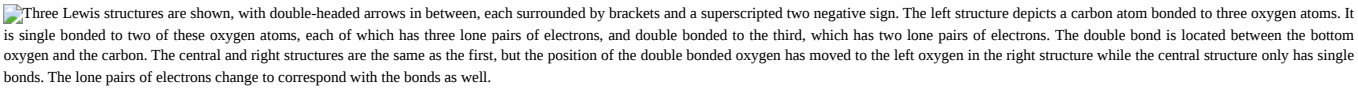
Three Lewis structures are shown, with double-headed arrows in between, each surrounded by brackets and a superscripted two negative sign. The left structure depicts a carbon atom bonded to three oxygen atoms. It is single bonded to two of these oxygen atoms, each of which has three lone pairs of electrons, and double bonded to the third, which has two lone pairs of electrons. The double bond is located between the bottom oxygen and the carbon. The central and right structures are the same as the first, but the position of the double bonded oxygen has moved to the left oxygen in the right structure while the central structure only has single bonds. The lone pairs of electrons change to correspond with the bonds as well.

;

(c)

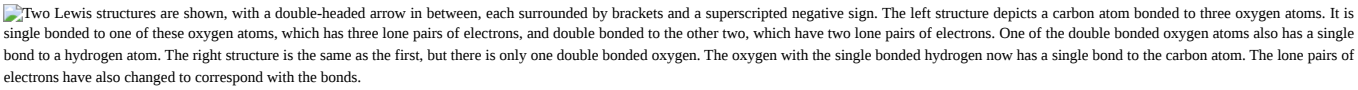
Two Lewis structures are shown, with a double-headed arrow in between, each surrounded by brackets and a superscripted negative sign. The left structure depicts a carbon atom bonded to three oxygen atoms. It is single bonded to one of these oxygen atoms, which has three lone pairs of electrons, and double bonded to the other two, which have two lone pairs of electrons. One of the double bonded oxygen atoms also has a single bond to a hydrogen atom. The right structure is the same as the first, but there is only one double bonded oxygen. The oxygen with the single bonded hydrogen now has a single bond to the carbon atom. The lone pairs of electrons have also changed to correspond with the bonds.

;

(d)

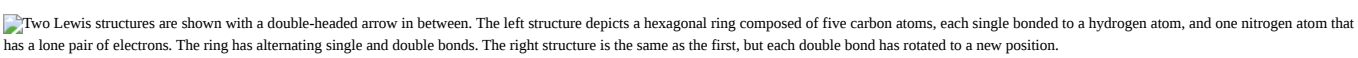
Two Lewis structures are shown with a double-headed arrow in between. The left structure depicts a hexagonal ring composed of five carbon atoms, each single bonded to a hydrogen atom, and one nitrogen atom that has a lone pair of electrons. The ring has alternating single and double bonds. The right structure is the same as the first, but each double bond has rotated to a new position.

;

(e)

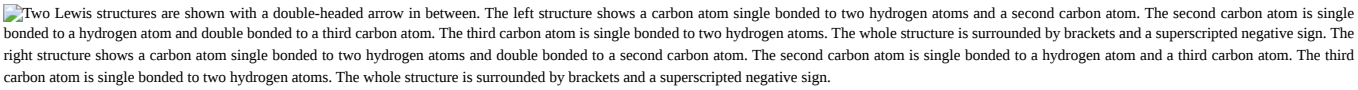
Two Lewis structures are shown with a double-headed arrow in between. The left structure shows a carbon atom single bonded to two hydrogen atoms and a second carbon atom. The second carbon atom is single bonded to a hydrogen atom and double bonded to a third carbon atom. The third carbon atom is single bonded to two hydrogen atoms. The whole structure is surrounded by brackets and a superscripted negative sign. The right structure shows a carbon atom single bonded to two hydrogen atoms and double bonded to a second carbon atom. The second carbon atom is single bonded to a hydrogen atom and a third carbon atom. The third carbon atom is single bonded to two hydrogen atoms. The whole structure is surrounded by brackets and a superscripted negative sign.

Write the resonance forms of ozone, O_3, the component of the upper atmosphere that protects the Earth from ultraviolet radiation.

Sodium nitrite, which has been used to preserve bacon and other meats, is an ionic compound. Write the resonance forms of the nitrite ion, NO_2^-.

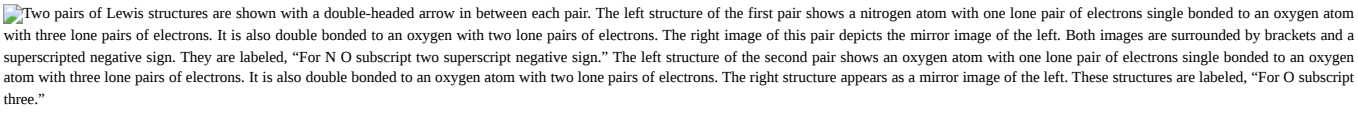
Two pairs of Lewis structures are shown with a double-headed arrow in between each pair. The left structure of the first pair shows a nitrogen atom with one lone pair of electrons single bonded to an oxygen atom with three lone pairs of electrons. It is also double bonded to an oxygen with two lone pairs of electrons. The right image of this pair depicts the mirror image of the left. Both images are surrounded by brackets and a superscripted negative sign. They are labeled, “For N O subscript two superscript negative sign.” The left structure of the second pair shows an oxygen atom with one lone pair of electrons single bonded to an oxygen atom with three lone pairs of electrons. It is also double bonded to an oxygen atom with two lone pairs of electrons. The right structure appears as a mirror image of the left. These structures are labeled, “For O subscript three.”

In terms of the bonds present, explain why acetic acid, CH_3CO_2H, contains two distinct types of carbon-oxygen bonds, whereas the acetate ion, formed by loss of a hydrogen ion from acetic acid, only contains one type of carbon-oxygen bond. The skeleton structures of these species are shown:

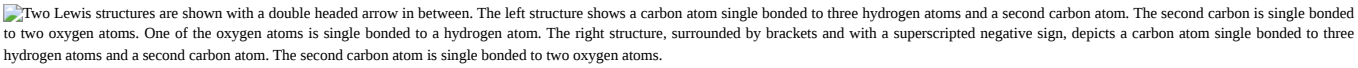
Two Lewis structures are shown with a double headed arrow in between. The left structure shows a carbon atom single bonded to three hydrogen atoms and a second carbon atom. The second carbon is single bonded to two oxygen atoms. One of the oxygen atoms is single bonded to a hydrogen atom. The right structure, surrounded by brackets and with a superscripted negative sign, depicts a carbon atom single bonded to three hydrogen atoms and a second carbon atom. The second carbon atom is single bonded to two oxygen atoms.

Write the Lewis structures for the following, and include resonance structures where appropriate. Indicate which has the strongest carbon-oxygen bond.

1. CO_2
2. CO

(a)

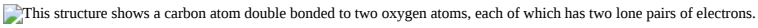
This structure shows a carbon atom double bonded to two oxygen atoms, each of which has two lone pairs of electrons.

(b)

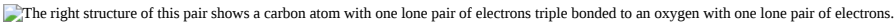
The right structure of this pair shows a carbon atom with one lone pair of electrons triple bonded to an oxygen with one lone pair of electrons.

CO has the strongest carbon-oxygen bond because there is a triple bond joining C and O. CO_2 has double bonds.

Toothpastes containing sodium hydrogen carbonate (sodium bicarbonate) and hydrogen peroxide are widely used. Write Lewis structures for the hydrogen carbonate ion and hydrogen peroxide molecule, with resonance forms where appropriate.

Determine the formal charge of each element in the following:

1. HCl
2. CF_4
3. PCl_3
4. PF_5

H: 0, Cl: 0; C: 0, F: 0; P: 0, Cl 0; P: 0, F: 0

Determine the formal charge of each element in the following:

1. H_3O^+
2. SO_4^{2-}
3. NH_3
4. O_2^{2-}
5. H_2O_2

Calculate the formal charge of chlorine in the molecules Cl_2, $BeCl_2$, and ClF_5.

Cl in Cl_2: 0; Cl in $BeCl_2$: 0; Cl in ClF_5: 0

Calculate the formal charge of each element in the following compounds and ions:

1. F_2CO
2. NO^-
3. BF_4^-
4. $SnCl_3^-$
5. H_2CCH_2
6. ClF_3

7. SeF_6
8. (h) PO_4^{3-}

Draw all possible resonance structures for each of these compounds. Determine the formal charge on each atom in each of the resonance structures:

1. O_3
2. SO_2
3. NO_2^-
4. NO_3^-

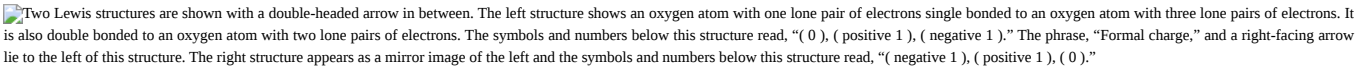
Two Lewis structures are shown with a double-headed arrow in between. The left structure shows an oxygen atom with one lone pair of electrons single bonded to an oxygen atom with three lone pairs of electrons. It is also double bonded to an oxygen atom with two lone pairs of electrons. The symbols and numbers below this structure read, “(0), (positive 1), (negative 1).” The phrase, “Formal charge,” and a right-facing arrow lie to the left of this structure. The right structure appears as a mirror image of the left and the symbols and numbers below this structure read, “(negative 1), (positive 1), (0).”

;

(b)

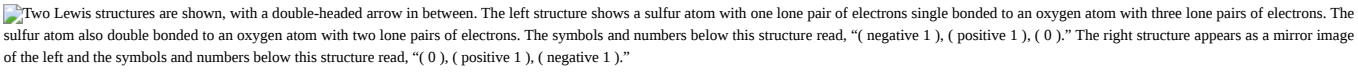
Two Lewis structures are shown, with a double-headed arrow in between. The left structure shows a sulfur atom with one lone pair of electrons single bonded to an oxygen atom with three lone pairs of electrons. The sulfur atom also double bonded to an oxygen atom with two lone pairs of electrons. The symbols and numbers below this structure read, “(negative 1), (positive 1), (0).” The right structure appears as a mirror image of the left and the symbols and numbers below this structure read, “(0), (positive 1), (negative 1).”

;

(c)

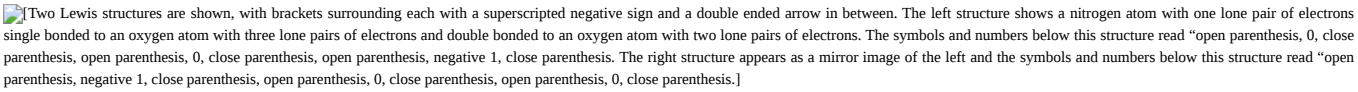
[Two Lewis structures are shown, with brackets surrounding each with a superscripted negative sign and a double ended arrow in between. The left structure shows a nitrogen atom with one lone pair of electrons single bonded to an oxygen atom with three lone pairs of electrons and double bonded to an oxygen atom with two lone pairs of electrons. The symbols and numbers below this structure read “open parenthesis, 0, close parenthesis, open parenthesis, 0, close parenthesis, open parenthesis, negative 1, close parenthesis. The right structure appears as a mirror image of the left and the symbols and numbers below this structure read “open parenthesis, negative 1, close parenthesis, open parenthesis, 0, close parenthesis, open parenthesis, 0, close parenthesis.]

;

(d)

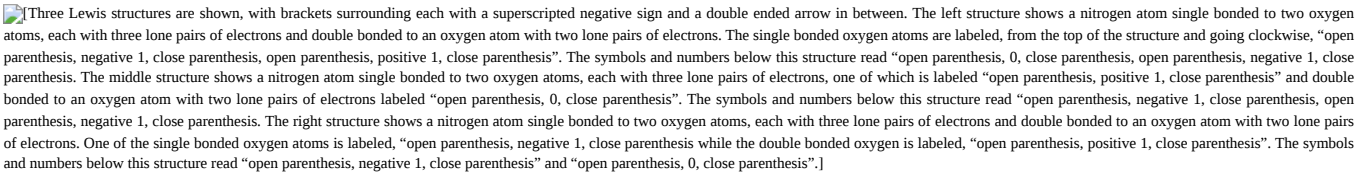
[Three Lewis structures are shown, with brackets surrounding each with a superscripted negative sign and a double ended arrow in between. The left structure shows a nitrogen atom single bonded to two oxygen atoms, each with three lone pairs of electrons and double bonded to an oxygen atom with two lone pairs of electrons. The single bonded oxygen atoms are labeled, from the top of the structure and going clockwise, “open parenthesis, negative 1, close parenthesis, open parenthesis, positive 1, close parenthesis”. The symbols and numbers below this structure read “open parenthesis, 0, close parenthesis, open parenthesis, negative 1, close parenthesis. The middle structure shows a nitrogen atom single bonded to two oxygen atoms, each with three lone pairs of electrons, one of which is labeled “open parenthesis, positive 1, close parenthesis” and double bonded to an oxygen atom with two lone pairs of electrons labeled “open parenthesis, 0, close parenthesis”. The symbols and numbers below this structure read “open parenthesis, negative 1, close parenthesis, open parenthesis, negative 1, close parenthesis. The right structure shows a nitrogen atom single bonded to two oxygen atoms, each with three lone pairs of electrons and double bonded to an oxygen atom with two lone pairs of electrons. One of the single bonded oxygen atoms is labeled, “open parenthesis, negative 1, close parenthesis while the double bonded oxygen is labeled, “open parenthesis, positive 1, close parenthesis”. The symbols and numbers below this structure read “open parenthesis, negative 1, close parenthesis” and “open parenthesis, 0, close parenthesis”.]

Based on formal charge considerations, which of the following would likely be the correct arrangement of atoms in nitrosyl chloride: ClNO or ClON?

Based on formal charge considerations, which of the following would likely be the correct arrangement of atoms in hypochlorous acid: HOCl or OClH?

HOCl

Based on formal charge considerations, which of the following would likely be the correct arrangement of atoms in sulfur dioxide: OSO or SOO?

Draw the structure of hydroxylamine, H_3NO, and assign formal charges; look up the structure. Is the actual structure consistent with the formal charges?

The structure that gives zero formal charges is consistent with the actual structure:

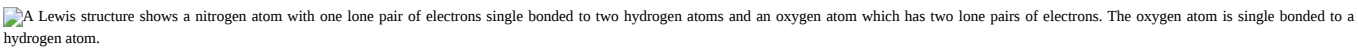
A Lewis structure shows a nitrogen atom with one lone pair of electrons single bonded to two hydrogen atoms and an oxygen atom which has two lone pairs of electrons. The oxygen atom is single bonded to a hydrogen atom.

Iodine forms a series of fluorides (listed here). Write Lewis structures for each of the four compounds and determine the formal charge of the iodine atom in each molecule:

1. IF
2. IF_3
3. IF_5
4. IF_7

Write the Lewis structure and chemical formula of the compound with a molar mass of about 70 g/mol that contains 19.7% nitrogen and 80.3% fluorine by mass, and determine the formal charge of the atoms in this compound.

NF_3;

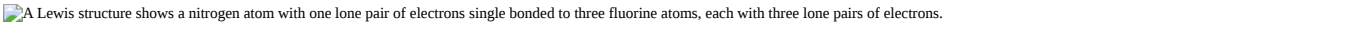
A Lewis structure shows a nitrogen atom with one lone pair of electrons single bonded to three fluorine atoms, each with three lone pairs of electrons.

Which of the following structures would we expect for nitrous acid? Determine the formal charges:

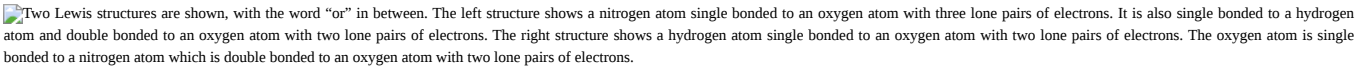
Two Lewis structures are shown, with the word “or” in between. The left structure shows a nitrogen atom single bonded to an oxygen atom with three lone pairs of electrons. It is also single bonded to a hydrogen atom and double bonded to an oxygen atom with two lone pairs of electrons. The right structure shows a hydrogen atom single bonded to an oxygen atom with two lone pairs of electrons. The oxygen atom is single bonded to a nitrogen atom which is double bonded to an oxygen atom with two lone pairs of electrons.

Sulfuric acid is the industrial chemical produced in greatest quantity worldwide. About 90 billion pounds are produced each year in the United States alone. Write the Lewis structure for sulfuric acid, H_2SO_4, which has two oxygen atoms and two OH groups bonded to the sulfur.

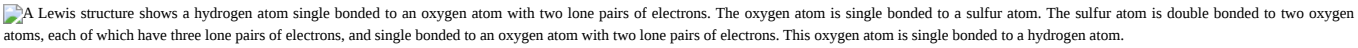
A Lewis structure shows a hydrogen atom single bonded to an oxygen atom with two lone pairs of electrons. The oxygen atom is single bonded to a sulfur atom. The sulfur atom is double bonded to two oxygen atoms, each of which have three lone pairs of electrons, and single bonded to an oxygen atom with two lone pairs of electrons. This oxygen atom is single bonded to a hydrogen atom.

7.6: Strengths of Ionic and Covalent Bonds

Which bond in each of the following pairs of bonds is the strongest?

1. C–C or $\mathbf{C=C}$
2. C–N or $\mathbf{C\equiv N}$
3. $\mathbf{C\equiv O}$ or $\mathbf{C=O}$
4. H–F or H–Cl
5. C–H or O–H
6. C–N or C–O

Using the bond energies in Table, determine the approximate enthalpy change for each of the following reactions:

1. $\mathbf{H_2}(g) + \mathbf{Br_2}(g) \longrightarrow \mathbf{2\,HBr}(g)$
2. $\mathbf{CH_4}(g) + \mathbf{I_2}(g) \longrightarrow \mathbf{CH_3I}(g) + \mathbf{HI}(g)$
3. (c) $\mathbf{C_2H_4}(g) + \mathbf{3\,O_2}(g) \longrightarrow \mathbf{2\,CO_2}(g) + \mathbf{2\,H_2O}(g)$

1. −114 kJ;
2. 30 kJ;
3. (c) −1055 kJ

Using the bond energies in Table, determine the approximate enthalpy change for each of the following reactions:

1. $\mathbf{Cl_2}(g) + \mathbf{3\,F_2}(g) \longrightarrow \mathbf{2\,ClF_3}(g)$
2. $\mathbf{H_2C=CH_2}(g) + \mathbf{H_2}(g) \longrightarrow \mathbf{H_3CCH_3}(g)$
3. (c) $\mathbf{2\,C_2H_6}(g) + \mathbf{7\,O_2}(g) \longrightarrow \mathbf{4\,CO_2}(g) + \mathbf{6\,H_2O}(g)$

When a molecule can form two different structures, the structure with the stronger bonds is usually the more stable form. Use bond energies to predict the correct structure of the hydroxylamine molecule:

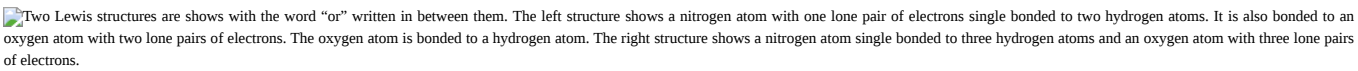
Two Lewis structures are shows with the word “or” written in between them. The left structure shows a nitrogen atom with one lone pair of electrons single bonded to two hydrogen atoms. It is also bonded to an oxygen atom with two lone pairs of electrons. The oxygen atom is bonded to a hydrogen atom. The right structure shows a nitrogen atom single bonded to three hydrogen atoms and an oxygen atom with three lone pairs of electrons.

The greater bond energy is in the figure on the left. It is the more stable form.

How does the bond energy of HCldiffer from the standard enthalpy of formation of HCl(g)?

Using the standard enthalpy of formation data in Appendix G, show how the standard enthalpy of formation of HCl(g) can be used to determine the bond energy.

$$\begin{aligned} \mathbf{HCl}(g) &\longrightarrow \frac{1}{2}\mathbf{H_2}(g) + \frac{1}{2}\mathbf{Cl_2}(g) \quad & \Delta H_1^\circ = -\Delta H_{f[\mathbf{HCl}(g)]}^\circ \\ \frac{1}{2}\mathbf{H_2}(g) &\longrightarrow \mathbf{H}(g) & \Delta H_2^\circ = \Delta H_{f[\mathbf{H}(g)]}^\circ \end{aligned}$$

$$\begin{array}{rr} \frac{1}{2}\mathrm{Cl_2}(g) \longrightarrow \mathrm{Cl}(g) & \Delta H_3^\circ = \Delta H_{f[\mathrm{Cl}(g)]}^\circ \\ \hline \mathrm{HCl}(g) \longrightarrow \mathrm{H}(g) + \mathrm{Cl}(g) & \Delta H_{298}^\circ = \Delta H_1^\circ + \Delta H_2^\circ + \Delta H_3^\circ \end{array}$$

$$D_{\mathrm{HCl}} = \Delta H_{298}^\circ = \Delta H_{f[\mathrm{HCl}(g)]}^\circ + \Delta H_{f[\mathrm{H}(g)]}^\circ + \Delta H_{f[\mathrm{Cl}(g)]}^\circ \quad (7.7.1)$$

$$= -(-92.307\ \mathrm{kJ}) + 217.97\ \mathrm{kJ} + 121.3\ \mathrm{kJ} \quad (7.7.2)$$

$$= 431.6\ \mathrm{kJ} \quad (7.7.3)$$

Using the standard enthalpy of formation data in Appendix G, calculate the bond energy of the carbon-sulfur double bond in CS_2.

Using the standard enthalpy of formation data in Appendix G, determine which bond is stronger: the S–F bond in $SF_4(g)$ or in $SF_6(g)$?

The S–F bond in SF_4 is stronger.

Using the standard enthalpy of formation data in Appendix G, determine which bond is stronger: the P–Cl bond in $PCl_3(g)$ or in $PCl_5(g)$?

Complete the following Lewis structure by adding bonds (not atoms), and then indicate the longest bond:

A Lewis structure is shown that is missing its bonds. It shows a horizontal row of six carbon atoms, equally spaced. Three hydrogen atoms are drawn around the first carbon, two around the second, one above the fifth, and two by the sixth.

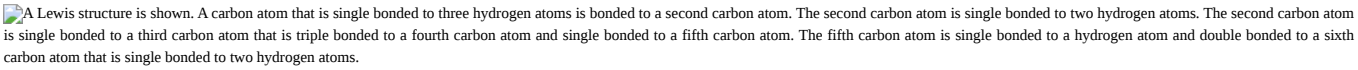
A Lewis structure is shown. A carbon atom that is single bonded to three hydrogen atoms is bonded to a second carbon atom. The second carbon atom is single bonded to two hydrogen atoms. The second carbon atom is single bonded to a third carbon atom that is triple bonded to a fourth carbon atom and single bonded to a fifth carbon atom. The fifth carbon atom is single bonded to a hydrogen atom and double bonded to a sixth carbon atom that is single bonded to two hydrogen atoms.

The C–C single bonds are longest.

Use the bond energy to calculate an approximate value of ΔH for the following reaction. Which is the more stable form of FNO_2?

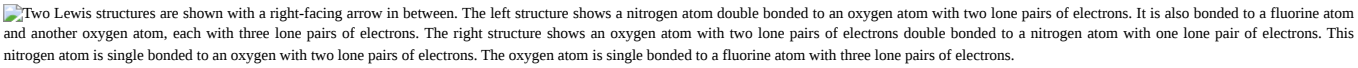
Two Lewis structures are shown with a right-facing arrow in between. The left structure shows a nitrogen atom double bonded to an oxygen atom with two lone pairs of electrons. It is also bonded to a fluorine atom and another oxygen atom, each with three lone pairs of electrons. The right structure shows an oxygen atom with two lone pairs of electrons double bonded to a nitrogen atom with one lone pair of electrons. This nitrogen atom is single bonded to an oxygen with two lone pairs of electrons. The oxygen atom is single bonded to a fluorine atom with three lone pairs of electrons.

Use principles of atomic structure to answer each of the following:[1]

1. The radius of the Ca atom is 197 pm; the radius of the Ca^{2+} ion is 99 pm. Account for the difference.
2. The lattice energy of CaO(*s*) is –3460 kJ/mol; the lattice energy of K_2O is –2240 kJ/mol. Account for the difference.
3. (c) Given these ionization values, explain the difference between Ca and K with regard to their first and second ionization energies.

Element	First Ionization Energy (kJ/mol)	Second Ionization Energy (kJ/mol)
K	419	3050
Ca	590	1140

The first ionization energy of Mg is 738 kJ/mol and that of Al is 578 kJ/mol. Account for this difference.

When two electrons are removed from the valence shell, the Ca radius loses the outermost energy level and reverts to the lower n = 3 level, which is much smaller in radius. The +2 charge on calcium pulls the oxygen much closer compared with K, thereby increasing the lattice energy relative to a less charged ion. (c) Removal of the 4*s* electron in Ca requires more energy than removal of the 4*s* electron in K because of the stronger attraction of the nucleus and the extra energy required to break the pairing of the electrons. The second ionization energy for K requires that an electron be removed from a lower energy level, where the attraction is much stronger from the nucleus for the electron. In addition, energy is required to unpair two electrons in a full orbital. For Ca, the second ionization potential requires removing only a lone electron in the exposed outer energy level. In Al, the removed electron is relatively unprotected and unpaired in a *p* orbital. The higher energy for Mg mainly reflects the unpairing of the 2*s* electron.

The lattice energy of LiF is 1023 kJ/mol, and the Li–F distance is 200.8 pm. NaF crystallizes in the same structure as LiF but with a Na–F distance of 231 pm. Which of the following values most closely approximates the lattice energy of NaF: 510, 890, 1023, 1175, or 4090 kJ/mol? Explain your choice.

For which of the following substances is the least energy required to convert one mole of the solid into separate ions?

1. MgO
2. SrO
3. (c) KF
4. CsF
5. MgF_2

(d)

The reaction of a metal, M, with a halogen, X_2, proceeds by an exothermic reaction as indicated by this equation: $\mathbf{M}(s) + \mathbf{X_2}(g) \longrightarrow \mathbf{MX_2}(s)$. For each of the following, indicate which option will make the reaction more exothermic. Explain your answers.

1. a large radius vs. a small radius for M^{+2}
2. a high ionization energy vs. a low ionization energy for M
3. (c) an increasing bond energy for the halogen
4. a decreasing electron affinity for the halogen
5. an increasing size of the anion formed by the halogen

The lattice energy of LiF is 1023 kJ/mol, and the Li–F distance is 201 pm. MgO crystallizes in the same structure as LiF but with a Mg–O distance of 205 pm. Which of the following values most closely approximates the lattice energy of MgO: 256 kJ/mol, 512 kJ/mol, 1023 kJ/mol, 2046 kJ/mol, or 4008 kJ/mol? Explain your choice.

4008 kJ/mol; both ions in MgO have twice the charge of the ions in LiF; the bond length is very similar and both have the same structure; a quadrupling of the energy is expected based on the equation for lattice energy

Which compound in each of the following pairs has the larger lattice energy? Note: Mg^{2+} and Li^+ have similar radii; O^{2-} and F^- have similar radii. Explain your choices.

1. MgO or MgSe
2. LiF or MgO
3. (c) Li_2O or LiCl
4. Li_2Se or MgO

Which compound in each of the following pairs has the larger lattice energy? Note: Ba^{2+} and

K^+ have similar radii; S^{2-} and Cl^- have similar radii. Explain your choices.

1. K_2O or Na_2O
2. K_2S or BaS
3. (c) KCl or BaS
4. BaS or $BaCl_2$

Na_2O; Na^+ has a smaller radius than K^+; BaS; Ba has a larger charge than K; (c) BaS; Ba and S have larger charges; BaS; S has a larger charge

Which of the following compounds requires the most energy to convert one mole of the solid into separate ions?

1. MgO
2. SrO
3. (c) KF
4. CsF
5. MgF_2

Which of the following compounds requires the most energy to convert one mole of the solid into separate ions?

1. K_2S
2. K_2O
3. (c) CaS
4. Cs_2S
5. CaO

(e)

The lattice energy of KF is 794 kJ/mol, and the interionic distance is 269 pm. The Na–F

distance in NaF, which has the same structure as KF, is 231 pm. Which of the following values is the closest approximation of the lattice energy of NaF: 682 kJ/mol, 794 kJ/mol, 924 kJ/mol, 1588 kJ/mol, or 3175 kJ/mol? Explain your answer.

7.7: Molecular Structure and Polarity

Explain why the HOH molecule is bent, whereas the HBeH molecule is linear.

The placement of the two sets of unpaired electrons in water forces the bonds to assume a tetrahedral arrangement, and the resulting HOH molecule is bent. The HBeH molecule (in which Be has only two electrons to bond with the two electrons from the hydrogens) must have the electron pairs as far from one another as possible and is therefore linear.

What feature of a Lewis structure can be used to tell if a molecule's (or ion's) electron-pair geometry and molecular structure will be identical?

Explain the difference between electron-pair geometry and molecular structure.

Space must be provided for each pair of electrons whether they are in a bond or are present as lone pairs. Electron-pair geometry considers the placement of all electrons. Molecular structure considers only the bonding-pair geometry.

Why is the H–N–H angle in NH_3 smaller than the H–C–H bond angle in CH_4? Why is the H–N–H angle in $\mathbf{NH_4^+}$ identical to the H–C–H bond angle in CH_4?

Explain how a molecule that contains polar bonds can be nonpolar.

As long as the polar bonds are compensated (for example. two identical atoms are found directly across the central atom from one another), the molecule can be nonpolar.

As a general rule, MX_n molecules (where M represents a central atom and X represents terminal atoms; n = 2 – 5) are polar if there is one or more lone pairs of electrons on M. NH_3 (M = N, X = H, n = 3) is an example. There are two molecular structures with lone pairs that are exceptions to this rule. What are they?

Predict the electron pair geometry and the molecular structure of each of the following molecules or ions:

1. SF_6
2. PCl_5
3. (c) BeH_2
4. $\mathbf{CH_3^+}$

1. Both the electron geometry and the molecular structure are octahedral.
2. Both the electron geometry and the molecular structure are trigonal bipyramid.
3. (c) Both the electron geometry and the molecular structure are linear.
4. Both the electron geometry and the molecular structure are trigonal planar.

Identify the electron pair geometry and the molecular structure of each of the following molecules or ions:

1. $\mathbf{IF_6^+}$
2. CF_4
3. (c) BF_3
4. $\mathbf{SiF_5^-}$
5. $BeCl_2$

What are the electron-pair geometry and the molecular structure of each of the following molecules or ions?

1. ClF_5
2. $\mathbf{ClO_2^-}$
3. (c) $\mathbf{TeCl_4^{2-}}$
4. PCl_3
5. SeF_4

6. $\mathbf{PH_2^-}$

electron-pair geometry: octahedral, molecular structure: square pyramidal; electron-pair geometry: tetrahedral, molecular structure: bent; (c) electron-pair geometry: octahedral, molecular structure: square planar; electron-pair geometry: tetrahedral, molecular structure: trigonal pyramidal; electron-pair geometry: trigonal bypyramidal, molecular structure: seesaw; electron-pair geometry: tetrahedral, molecular structure: bent (109°)

Predict the electron pair geometry and the molecular structure of each of the following ions:

1. H_3O^+
2. $\mathbf{PCl_4^-}$
3. (c) $\mathbf{SnCl_3^-}$
4. $\mathbf{BrCl_4^-}$
5. ICl_3
6. XeF_4
7. (g) SF_2

Identify the electron pair geometry and the molecular structure of each of the following molecules:

1. ClNO (N is the central atom)
2. CS_2
3. (c) Cl_2CO (C is the central atom)
4. Cl_2SO (S is the central atom)
5. SO_2F_2 (S is the central atom)
6. XeO_2F_2 (Xe is the central atom)
7. (g) $\mathbf{ClOF_2^+}$ (Cl is the central atom)

electron-pair geometry: trigonal planar, molecular structure: bent (120°); electron-pair geometry: linear, molecular structure: linear; (c) electron-pair geometry: trigonal planar, molecular structure: trigonal planar; electron-pair geometry: tetrahedral, molecular structure: trigonal pyramidal; electron-pair geometry: tetrahedral, molecular structure: tetrahedral; electron-pair geometry: trigonal bipyramidal, molecular structure: seesaw; (g) electron-pair geometry: tetrahedral, molecular structure: trigonal pyramidal

Predict the electron pair geometry and the molecular structure of each of the following:

1. IOF_5 (I is the central atom)
2. $POCl_3$ (P is the central atom)
3. (c) Cl_2SeO (Se is the central atom)
4. $ClSO^+$ (S is the central atom)
5. F_2SO (S is the central atom)
6. $\mathbf{NO_2^-}$
7. (g) $\mathbf{SiO_4^{4-}}$

Which of the following molecules and ions contain polar bonds? Which of these molecules and ions have dipole moments?

1. ClF_5
2. $\mathbf{ClO_2^-}$
3. (c) $\mathbf{TeCl_4^{2-}}$
4. PCl_3
5. SeF_4
6. $\mathbf{PH_2^-}$
7. (g) XeF_2

All of these molecules and ions contain polar bonds. Only ClF_5, $\mathbf{ClO_2^-}$, PCl_3, SeF_4, and $\mathbf{PH_2^-}$ have dipole moments.

Which of the molecules and ions in Exercise contain polar bonds? Which of these molecules and ions have dipole moments?

1. H_3O^+
2. $\mathbf{PCl_4^-}$

3. (c) $\mathbf{SnCl_3^-}$
4. $\mathbf{BrCl_4^-}$
5. ICl_3
6. XeF_4
7. (g) SF_2

Which of the following molecules have dipole moments?

1. CS_2
2. SeS_2
3. (c) CCl_2F_2
4. PCl_3 (P is the central atom)
5. ClNO (N is the central atom)

SeS_2, CCl_2F_2, PCl_3, and ClNO all have dipole moments.

Identify the molecules with a dipole moment:

1. SF_4
2. CF_4
3. (c) Cl_2CCBr_2
4. CH_3Cl
5. H_2CO

The molecule XF_3 has a dipole moment. Is X boron or phosphorus?

P

The molecule XCl_2 has a dipole moment. Is X beryllium or sulfur?

Is the Cl_2BBCl_2 molecule polar or nonpolar?

nonpolar

There are three possible structures for PCl_2F_3 with phosphorus as the central atom. Draw them and discuss how measurements of dipole moments could help distinguish among them.

Describe the molecular structure around the indicated atom or atoms:

1. the sulfur atom in sulfuric acid, H_2SO_4 [$(HO)_2SO_2$]
2. the chlorine atom in chloric acid, $HClO_3$ [$HOClO_2$]
3. (c) the oxygen atom in hydrogen peroxide, HOOH
4. the nitrogen atom in nitric acid, HNO_3 [$HONO_2$]
5. the oxygen atom in the OH group in nitric acid, HNO_3 [$HONO_2$]
6. the central oxygen atom in the ozone molecule, O_3
7. (g) each of the carbon atoms in propyne, CH_3CCH
8. (h) the carbon atom in Freon, CCl_2F_2
9. (i) each of the carbon atoms in allene, H_2CCCH_2

tetrahedral; trigonal pyramidal; (c) bent (109°); trigonal planar; bent (109°); bent (109°); (g) CH_3CCH tetrahedral, CH_3CCH linear; (h) tetrahedral; (i) H_2CCCH_2 linear; H_2CCCH_2 trigonal planar

Draw the Lewis structures and predict the shape of each compound or ion:

1. CO_2
2. $\mathbf{NO_2^-}$
3. (c) SO_3
4. $\mathbf{SO_3^{2-}}$

A molecule with the formula AB_2, in which A and B represent different atoms, could have one of three different shapes. Sketch and name the three different shapes that this molecule might have. Give an example of a molecule or ion for each shape.

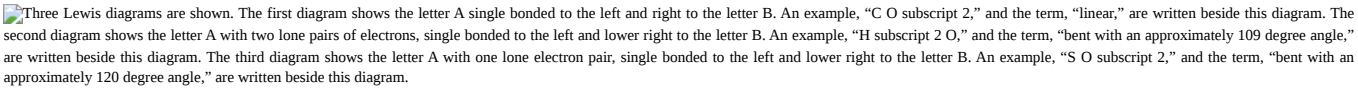

A molecule with the formula AB_3, in which A and B represent different atoms, could have one of three different shapes. Sketch and name the three different shapes that this molecule might have. Give an example of a molecule or ion that has each shape.

Draw the Lewis electron dot structures for these molecules, including resonance structures where appropriate:

1. CS_3^{2-}
2. CS_2
3. (c) CS

predict the molecular shapes for CS_3^{2-} and CS_2 and explain how you arrived at your predictions

(a)

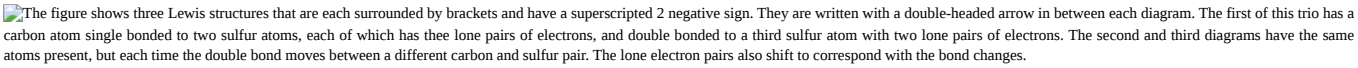

;

(b)

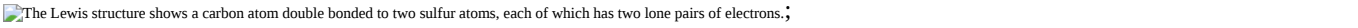

(c)

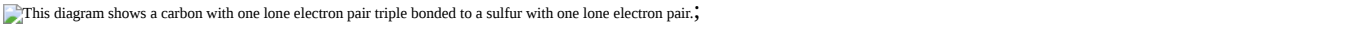

CS_3^{2-} includes three regions of electron density (all are bonds with no lone pairs); the shape is trigonal planar; CS_2 has only two regions of electron density (all bonds with no lone pairs); the shape is linear

What is the molecular structure of the stable form of FNO_2? (N is the central atom.)

A compound with a molar mass of about 42 g/mol contains 85.7% carbon and 14.3% hydrogen. What is its molecular structure?

The Lewis structure is made from three units, but the atoms must be rearranged:

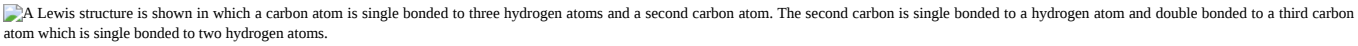

Use the simulation to perform the following exercises for a two-atom molecule:

1. Adjust the electronegativity value so the bond dipole is pointing toward B. Then determine what the electronegativity values must be to switch the dipole so that it points toward A.
2. With a partial positive charge on A, turn on the electric field and describe what happens.
3. (c) With a small partial negative charge on A, turn on the electric field and describe what happens.
4. Reset all, and then with a large partial negative charge on A, turn on the electric field and describe what happens.

Use the simulation to perform the following exercises for a real molecule. You may need to rotate the molecules in three dimensions to see certain dipoles.

1. Sketch the bond dipoles and molecular dipole (if any) for O_3. Explain your observations.
2. Look at the bond dipoles for NH_3. Use these dipoles to predict whether N or H is more electronegative.
3. (c) Predict whether there should be a molecular dipole for NH_3 and, if so, in which direction it will point. Check the molecular dipole box to test your hypothesis.

The molecular dipole points away from the hydrogen atoms.

Use the Molecule Shape simulator to build a molecule. Starting with the central atom, click on the double bond to add one double bond. Then add one single bond and one lone pair. Rotate the molecule to observe the complete geometry. Name the electron group geometry and molecular structure and predict the bond angle. Then click the check boxes at the bottom and right of the simulator to check your answers.

Use the Molecule Shape simulator to explore real molecules. On the Real Molecules tab, select H_2O. Switch between the “real” and “model” modes. Explain the difference observed.

The structures are very similar. In the model mode, each electron group occupies the same amount of space, so the bond angle is shown as 109.5°. In the “real” mode, the lone pairs are larger, causing the hydrogens to be compressed. This leads to the smaller angle of 104.5°.

Use the Molecule Shape simulator to explore real molecules. On the Real Molecules tab, select “model” mode and S_2O. What is the model bond angle? Explain whether the “real” bond angle should be larger or smaller than the ideal model angle.

This page titled 7.7: Chemical Bonding and Molecular Geometry (Exercises) is shared under a CC BY license and was authored, remixed, and/or curated by OpenStax.

CHAPTER OVERVIEW

8: Gases

A general chemistry Libretexts Textmap organized around the textbook
General Chemistry -Atoms First
By OpenStax

I II III IV V VI VII VIII IX X XI XII XIII XIV XV XVI XVII XVIII XIX XX XXI ● **Homework**

In this chapter, we examine the relationships between gas temperature, pressure, amount, and volume. We will study a simple theoretical model and use it to analyze the experimental behavior of gases. The results of these analyses will show us the limitations of the theory and how to improve on it.

Topic hierarchy

8.1: Gas Pressure
8.2: The Ideal Gas Law
8.3: Stoichiometry of Gaseous Substances, Mixtures, and Reactions
8.4: Effusion and Diffusion of Gases
8.5: The Kinetic-Molecular Theory

Contributors

- Paul Flowers (University of North Carolina - Pembroke), Klaus Theopold (University of Delaware) and Richard Langley (Stephen F. Austin State University) with contributing authors. Textbook content produced by OpenStax College is licensed under a Creative Commons Attribution License 4.0 license. Download for free at http://cnx.org/contents/85abf193-2bd...a7ac8df6@9.110).

This page titled 8: Gases is shared under a CC BY license and was authored, remixed, and/or curated by OpenStax.

8.1: Gas Pressure

Learning Objectives

- Define the property of pressure
- Define and convert among the units of pressure measurements
- Describe the operation of common tools for measuring gas pressure
- Calculate pressure from manometer data

The earth's atmosphere exerts a pressure, as does any other gas. Although we do not normally notice atmospheric pressure, we are sensitive to pressure changes—for example, when your ears "pop" during take-off and landing while flying, or when you dive underwater. Gas pressure is caused by the force exerted by gas molecules colliding with the surfaces of objects (Figure 8.1.1). Although the force of each collision is very small, any surface of appreciable area experiences a large number of collisions in a short time, which can result in a high pressure. In fact, normal air pressure is strong enough to crush a metal container when not balanced by equal pressure from inside the container.

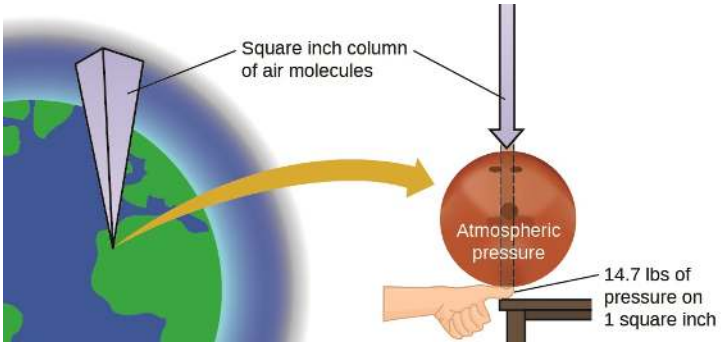

Figure 8.1.1: The atmosphere above us exerts a large pressure on objects at the surface of the earth, roughly equal to the weight of a bowling ball pressing on an area the size of a human thumbnail.

Atmospheric pressure is caused by the weight of the column of air molecules in the atmosphere above an object, such as the tanker car. At sea level, this pressure is roughly the same as that exerted by a full-grown African elephant standing on a doormat, or a typical bowling ball resting on your thumbnail. These may seem like huge amounts, and they are, but life on earth has evolved under such atmospheric pressure. If you actually perch a bowling ball on your thumbnail, the pressure experienced is twice the usual pressure, and the sensation is unpleasant.

A dramatic illustration of atmospheric pressure is provided in this brief video, which shows a railway tanker car imploding when its internal pressure is decreased.

Pressure is defined as the force exerted on a given area:

$$P = \frac{F}{A} \tag{8.1.1}$$

Since pressure is directly proportional to force and inversely proportional to area (Equation 8.1.1), pressure can be increased either by either **increasing** the amount of force or by **decreasing** the area over which it is applied. Correspondingly, pressure can be decreased by either **decreasing** the force or **increasing** the area.

Let's apply the definition of pressure (Equation 8.1.1) to determine which would be more likely to fall through thin ice in Figure 8.1.2.—the elephant or the figure skater?

Figure 8.1.2: Although (a) an elephant's weight is large, creating a very large force on the ground, (b) the figure skater exerts a much higher pressure on the ice due to the small surface area of her skates. (credit a: modification of work by Guido da Rozze; credit b: modification of work by Ryosuke Yagi).

A large African elephant can weigh 7 tons, supported on four feet, each with a diameter of about 1.5 ft (footprint area of 250 in^2), so the pressure exerted by each foot is about 14 lb/in^2:

$$\text{pressure per elephant foot} = 14,000\frac{\text{lb}}{\text{elephant}} \times \frac{1\text{ elephant}}{4\text{ feet}} \times \frac{1\text{ foot}}{250\text{ in}^2} = 14\text{ lb/in}^2 \tag{8.1.2}$$

The figure skater weighs about 120 lbs, supported on two skate blades, each with an area of about 2 in^2, so the pressure exerted by each blade is about 30 lb/in^2:

$$\text{pressure per skate blade} = 120\frac{\text{lb}}{\text{skater}} \times \frac{1\text{ skater}}{2\text{ blades}} \times \frac{1\text{ blade}}{2\text{ in}^2} = 30\text{ lb/in}^2 \tag{8.1.3}$$

Even though the elephant is more than one hundred-times heavier than the skater, it exerts less than one-half of the pressure and would therefore be less likely to fall though thin ice. On the other hand, if the skater removes her skates and stands with bare feet (or regular footwear) on the ice, the larger area over which her weight is applied greatly reduces the pressure exerted:

$$\text{pressure per human foot} = 120\frac{\text{lb}}{\text{skater}} \times \frac{1\text{ skater}}{2\text{ feet}} \times \frac{1\text{ foot}}{30\text{ in}^2} = 2\text{ lb/in}^2 \tag{8.1.4}$$

The SI unit of pressure is the pascal (Pa), with 1 Pa = 1 N/m^2, where N is the newton, a unit of force defined as 1 kg m/s^2. One pascal is a small pressure; in many cases, it is more convenient to use units of kilopascal (1 kPa = 1000 Pa) or bar (1 bar = 100,000 Pa). In the United States, pressure is often measured in pounds of force on an area of one square inch—pounds per square inch (psi)—for example, in car tires. Pressure can also be measured using the unit atmosphere (atm), which originally represented the average sea level air pressure at the approximate latitude of Paris (45°). Table 8.1.1 provides some information on these and a few other common units for pressure measurements

Table* 8.1.1*: *Pressure Units*

Unit Name and Abbreviation	Definition or Relation to Other Unit	Comment
pascal (Pa)	1 Pa = 1 N/m^2	recommended IUPAC unit
kilopascal (kPa)	1 kPa = 1000 Pa	
pounds per square inch (psi)	air pressure at sea level is ~14.7 psi	
atmosphere (atm)	1 atm = 101,325 Pa	air pressure at sea level is ~1 atm
bar (bar, or b)	1 bar = 100,000 Pa (exactly)	commonly used in meteorology
millibar (mbar, or mb)	1000 mbar = 1 bar	
inches of mercury (in. Hg)	1 in. Hg = 3386 Pa	used by aviation industry, also some weather reports
torr	$1\ \text{torr} = \frac{1}{760}\ \text{atm}$	named after Evangelista Torricelli, inventor of the barometer
millimeters of mercury (mm Hg)	1 mm Hg ~1 torr	

Example 8.1.1: Conversion of Pressure Units

The United States National Weather Service reports pressure in both inches of Hg and millibars. Convert a pressure of 29.2 in. Hg into:

a. torr
b. atm
c. kPa
d. mbar

Solution

This is a unit conversion problem. The relationships between the various pressure units are given in Table 9.2.1.

a. $29.2\ \text{in Hg} \times \frac{25.4\ \text{mm}}{1\ \text{in}} \times \frac{1\ \text{torr}}{1\ \text{mm Hg}} = 742\ \text{torr}$

b. $742\ \text{torr} \times \frac{1\ \text{atm}}{760\ \text{torr}} = 0.976\ \text{atm}$

c. $742\ \text{torr} \times \frac{101.325\ \text{kPa}}{760\ \text{torr}} = 98.9\ \text{kPa}$

d. $98.9\ \text{kPa} \times \frac{1000\ \text{Pa}}{1\ \text{kPa}} \times \frac{1\ \text{bar}}{100,000\ \text{Pa}} \times \frac{1000\ \text{mbar}}{1\ \text{bar}} = 989\ \text{mbar}$

Exercise 8.1.1

A typical barometric pressure in Kansas City is 740 torr. What is this pressure in atmospheres, in millimeters of mercury, in kilopascals, and in bar?

Answer

0.974 atm; 740 mm Hg; 98.7 kPa; 0.987 bar

We can measure atmospheric pressure, the force exerted by the atmosphere on the earth's surface, with a barometer (Figure **8.1.3**). A barometer is a glass tube that is closed at one end, filled with a nonvolatile liquid such as mercury, and then inverted and immersed in a container of that liquid. The atmosphere exerts pressure on the liquid outside the tube, the column of liquid exerts

pressure inside the tube, and the pressure at the liquid surface is the same inside and outside the tube. The height of the liquid in the tube is therefore proportional to the pressure exerted by the atmosphere.

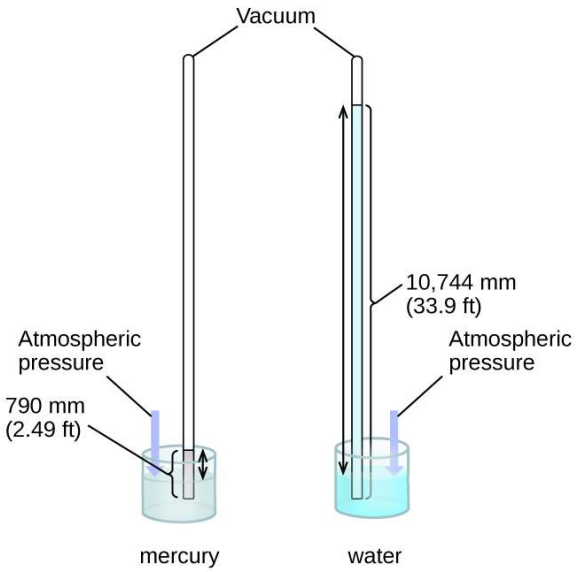

Figure 8.1.3: In a barometer, the height, h, of the column of liquid is used as a measurement of the air pressure. Using very dense liquid mercury (left) permits the construction of reasonably sized barometers, whereas using water (right) would require a barometer more than 30 feet tall.

If the liquid is water, normal atmospheric pressure will support a column of water over 10 meters high, which is rather inconvenient for making (and reading) a barometer. Because mercury (Hg) is about 13.6-times denser than water, a mercury barometer only needs to be $\frac{1}{13.6}$ as tall as a water barometer—a more suitable size. Standard atmospheric pressure of 1 atm at sea level (101,325 Pa) corresponds to a column of mercury that is about 760 mm (29.92 in.) high. The torr was originally intended to be a unit equal to one millimeter of mercury, but it no longer corresponds exactly.

Application: Measuring Blood Pressure

Blood pressure is measured using a device called a sphygmomanometer (Greek *sphygmos* = "pulse"). It consists of an inflatable cuff to restrict blood flow, a manometer to measure the pressure, and a method of determining when blood flow begins and when it becomes impeded (Figure 8.1.5). Since its invention in 1881, it has been an essential medical device. There are many types of sphygmomanometers: manual ones that require a stethoscope and are used by medical professionals; mercury ones, used when the most accuracy is required; less accurate mechanical ones; and digital ones that can be used with little training but that have limitations. When using a sphygmomanometer, the cuff is placed around the upper arm and inflated until blood flow is completely blocked, then slowly released. As the heart beats, blood forced through the arteries causes a rise in pressure. This rise in pressure at which blood flow begins is the *systolic pressure*—the peak pressure in the cardiac cycle. When the cuff's pressure equals the arterial systolic pressure, blood flows past the cuff, creating audible sounds that can be heard using a stethoscope. This is followed by a decrease in pressure as the heart's ventricles prepare for another beat. As cuff pressure continues to decrease, eventually sound is no longer heard; this is the *diastolic pressure*—the lowest pressure (resting phase) in the cardiac cycle. Blood pressure units from a sphygmomanometer are in terms of millimeters of mercury (mm Hg).

Figure 8.1.5: (a) A medical technician prepares to measure a patient's blood pressure with a sphygmomanometer. (b) A typical sphygmomanometer uses a valved rubber bulb to inflate the cuff and a diaphragm gauge to measure pressure. (credit a: modification of work by Master Sgt. Jeffrey Allen)

Meteorology, Climatology, and Atmospheric Science

Throughout the ages, people have observed clouds, winds, and precipitation, trying to discern patterns and make predictions: when it is best to plant and harvest; whether it is safe to set out on a sea voyage; and much more. We now face complex weather and atmosphere-related challenges that will have a major impact on our civilization and the ecosystem. Several different scientific disciplines use chemical principles to help us better understand weather, the atmosphere, and climate. These are meteorology, climatology, and atmospheric science. Meteorology is the study of the atmosphere, atmospheric phenomena, and atmospheric effects on earth's weather. Meteorologists seek to understand and predict the weather in the short term, which can save lives and benefit the economy. Weather forecasts (Figure **8.1.5**) are the result of thousands of measurements of air pressure, temperature, and the like, which are compiled, modeled, and analyzed in weather centers worldwide.

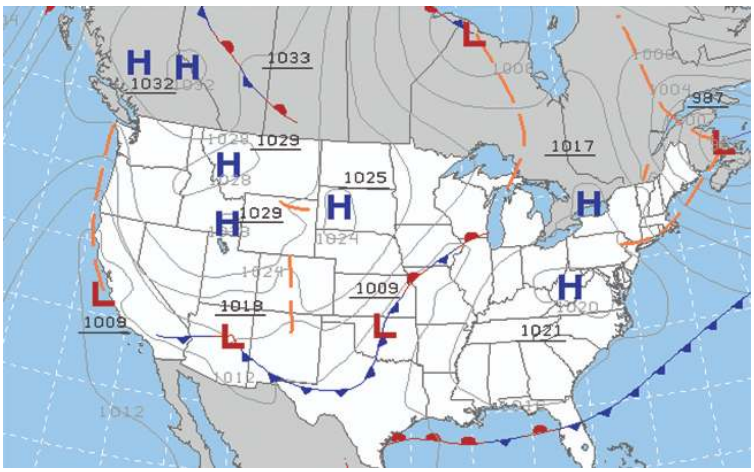

Figure **8.1.6**: Meteorologists use weather maps to describe and predict weather. Regions of high (H) and low (L) pressure have large effects on weather conditions. The gray lines represent locations of constant pressure known as isobars. (credit: modification of work by National Oceanic and Atmospheric Administration)

In terms of weather, low-pressure systems occur when the earth's surface atmospheric pressure is lower than the surrounding environment: Moist air rises and condenses, producing clouds. Movement of moisture and air within various weather fronts instigates most weather events.

The atmosphere is the gaseous layer that surrounds a planet. Earth's atmosphere, which is roughly 100–125 km thick, consists of roughly 78.1% nitrogen and 21.0% oxygen, and can be subdivided further into the regions shown in Figure **8.1.7**: the exosphere (furthest from earth, > 700 km above sea level), the thermosphere (80–700 km), the mesosphere (50–80 km), the stratosphere (second lowest level of our atmosphere, 12–50 km above sea level), and the troposphere (up to 12 km above sea level, roughly 80% of the earth's atmosphere by mass and the layer where most weather events originate). As you go higher in the troposphere, air density and temperature both decrease.

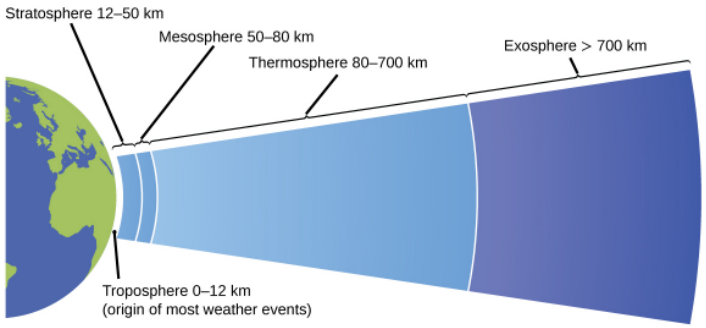

Figure **8.1.7**: Earth's atmosphere has five layers: the troposphere, the stratosphere, the mesosphere, the thermosphere, and the exosphere.

Climatology is the study of the climate, averaged weather conditions over long time periods, using atmospheric data. However, climatologists study patterns and effects that occur over decades, centuries, and millennia, rather than shorter time frames of hours, days, and weeks like meteorologists. Atmospheric science is an even broader field, combining meteorology, climatology, and other scientific disciplines that study the atmosphere.

Summary

Gases exert pressure, which is force per unit area. The pressure of a gas may be expressed in the SI unit of pascal or kilopascal, as well as in many other units including torr, atmosphere, and bar. Atmospheric pressure is measured using a barometer; other gas pressures can be measured using one of several types of manometers.

Key Equations

- $P = \frac{F}{A}$

Glossary

atmosphere (atm)
unit of pressure; 1 atm = 101,325 Pa

bar
(bar or b) unit of pressure; 1 bar = 100,000 Pa

barometer
device used to measure atmospheric pressure

hydrostatic pressure
pressure exerted by a fluid due to gravity

manometer
device used to measure the pressure of a gas trapped in a container

pascal (Pa)
SI unit of pressure; 1 Pa = 1 N/m^2

pounds per square inch (psi)
unit of pressure common in the US

pressure
force exerted per unit area

torr

unit of pressure; $1\ \text{torr} = \frac{1}{760}\ \text{atm}$

Contributors

- Paul Flowers (University of North Carolina - Pembroke), Klaus Theopold (University of Delaware) and Richard Langley (Stephen F. Austin State University) with contributing authors. Textbook content produced by OpenStax College is licensed under a Creative Commons Attribution License 4.0 license. Download for free at http://cnx.org/contents/85abf193-2bd...a7ac8df6@9.110).

This page titled 8.1: Gas Pressure is shared under a CC BY license and was authored, remixed, and/or curated by OpenStax.

8.2: The Ideal Gas Law

Learning Objectives

- Identify the mathematical relationships between the various properties of gases
- Use the ideal gas law, and related gas laws, to compute the values of various gas properties under specified conditions

During the seventeenth and especially eighteenth centuries, driven both by a desire to understand nature and a quest to make balloons in which they could fly (Figure **8.2.1**), a number of scientists established the relationships between the macroscopic physical properties of gases, that is, pressure, volume, temperature, and amount of gas. Although their measurements were not precise by today's standards, they were able to determine the mathematical relationships between pairs of these variables (e.g., pressure and temperature, pressure and volume) that hold for an *ideal* gas—a hypothetical construct that real gases approximate under certain conditions. Eventually, these individual laws were combined into a single equation—the *ideal gas law*—that relates gas quantities for gases and is quite accurate for low pressures and moderate temperatures. We will consider the key developments in individual relationships (for pedagogical reasons not quite in historical order), then put them together in the ideal gas law.

Figure **8.2.1**: In 1783, the first (a) hydrogen-filled balloon flight, (b) manned hot air balloon flight, and (c) manned hydrogen-filled balloon flight occurred. When the hydrogen-filled balloon depicted in (a) landed, the frightened villagers of Gonesse reportedly destroyed it with pitchforks and knives. The launch of the latter was reportedly viewed by 400,000 people in Paris.

This figure includes three images. Image a is a black and white image of a hydrogen balloon apparently being deflated by a mob of people. In image b, a blue, gold, and red balloon is being held to the ground with ropes while positioned above a platform from which smoke is rising beneath the balloon. In c, an image is shown in grey on a peach-colored background of an inflated balloon with vertical striping in the air. It appears to have a basket attached to its lower side. A large stately building appears in the background.

Pressure and Temperature: Amontons's Law

Imagine filling a rigid container attached to a pressure gauge with gas and then sealing the container so that no gas may escape. If the container is cooled, the gas inside likewise gets colder and its pressure is observed to decrease. Since the container is rigid and tightly sealed, both the volume and number of moles of gas remain constant. If we heat the sphere, the gas inside gets hotter (Figure **8.2.2**) and the pressure increases.

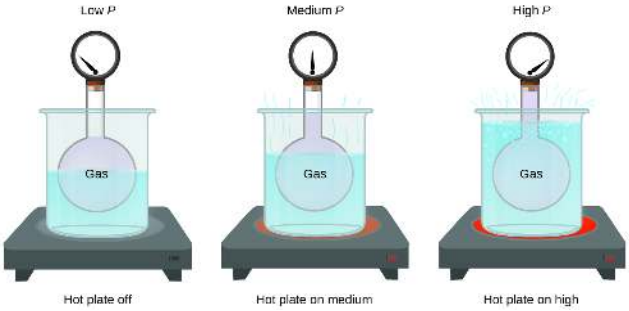

Figure **8.2.2**: The effect of temperature on gas pressure: When the hot plate is off, the pressure of the gas in the sphere is relatively low. As the gas is heated, the pressure of the gas in the sphere increases.

This figure includes three similar diagrams. In the first diagram to the left, a rigid spherical container of a gas to which a pressure gauge is attached at the top is placed in a large beaker of water, indicated in light blue, atop a hot plate. The needle on the pressure gauge points to the far left on the gauge. The diagram is labeled "low P" above and "hot plate off" below. The second similar diagram also has the rigid spherical container of gas placed in a large beaker from which light blue wavy line segments extend from the top of the liquid in the beaker. The beaker is situated on top of a slightly reddened circular area. The needle on the pressure gauge points straight up, or to the middle on the gauge. The diagram is labeled "medium P" above and "hot plate on medium" below. The third diagram also has the rigid spherical container of gas placed in a large beaker in which bubbles appear near the liquid surface and several wavy light blue line segments extend from the surface out of the beaker. The beaker is situated on top of a bright red circular area. The needle on the pressure gauge points to the far right on the gauge. The diagram is labeled "high P" above and "hot plate on high" below.

This relationship between temperature and pressure is observed for any sample of gas confined to a constant volume. An example of experimental pressure-temperature data is shown for a sample of air under these conditions in Figure **8.2.3**. We find that temperature and pressure are linearly related, and if the temperature is on the kelvin scale, then P and T are directly proportional (again, when *volume and moles of gas are held constant*); if the temperature on the kelvin scale increases by a certain factor, the gas pressure increases by the same factor.

Temperature (°C)	Temperature (K)	Pressure (kPa)
–150	173	36.0
–100	223	46.4
–50	273	56.7
0	323	67.1
50	373	77.5
100	423	88.0

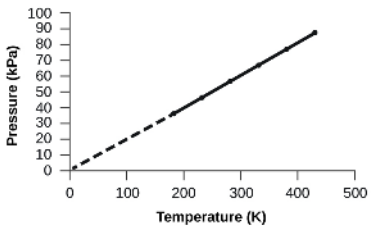

Figure **8.2.3**: For a constant volume and amount of air, the pressure and temperature are directly proportional, provided the temperature is in kelvin. (Measurements cannot be made at lower temperatures because of the condensation of the gas.) When this line is extrapolated to lower pressures, it reaches a pressure of 0 at –273 °C, which is 0 on the kelvin scale and the lowest possible temperature, called absolute zero.

This figure includes a table and a graph. The table has 3 columns and 7 rows. The first row is a header, which labels the columns "Temperature, degrees C," "Temperature, K," and "Pressure, k P a." The first column contains the values from top to bottom negative 150, negative 100, negative 50, 0, 50, and 100. The second column contains the values from top to bottom 173, 223, 273, 323, 373, and 423. The third column contains the values 36.0, 46.4, 56.7, 67.1, 77.5, and 88.0. A graph appears to the right of the table. The horizontal axis is labeled "Temperature (K)." with markings and labels provided for multiples of 100 beginning at 0 and ending at 500. The vertical axis is labeled "Pressure (k P a)" with markings and labels provided for multiples of 10, beginning at 0 and ending at 100. Six data points from the table are plotted on the graph with black dots. These dots are connected with a solid black line. A dashed line extends from the data point furthest to the left to the origin. The graph shows a positive linear trend.

Guillaume Amontons was the first to empirically establish the relationship between the pressure and the temperature of a gas (~1700), and Joseph Louis Gay-Lussac determined the relationship more precisely (~1800). Because of this, the *P-T* relationship for gases is known as either Amontons's law or Gay-Lussac's law. Under either name, it states that *the pressure of a given amount of*

gas is directly proportional to its temperature on the kelvin scale when the volume is held constant. Mathematically, this can be written:

$$P \propto T \text{ or } P = \text{constant} \times T \text{ or } P = k \times T$$

where ∝ means "is proportional to," and k is a proportionality constant that depends on the identity, amount, and volume of the gas.

For a confined, constant volume of gas, the ratio $\frac{P}{T}$ is therefore constant (i.e., $\frac{P}{T} = k$). If the gas is initially in "Condition 1" (with $P = P_1$ and $T = T_1$), and then changes to "Condition 2" (with $P = P_2$ and $T = T_2$), we have that $\frac{P_1}{T_1} = k$ and $\frac{P_2}{T_2} = k$, which reduces to $\frac{P_1}{T_1} = \frac{P_2}{T_2}$. This equation is useful for pressure-temperature calculations for a confined gas at constant volume. Note that temperatures must be on the kelvin scale for any gas law calculations (0 on the kelvin scale and the lowest possible temperature is called absolute zero). (Also note that there are at least three ways we can describe how the pressure of a gas changes as its temperature changes: We can use a table of values, a graph, or a mathematical equation.)

Example 8.2.1: Predicting Change in Pressure with Temperature

A can of hair spray is used until it is empty except for the propellant, isobutane gas.

a. On the can is the warning "Store only at temperatures below 120 °F (48.8 °C). Do not incinerate." Why?
b. The gas in the can is initially at 24 °C and 360 kPa, and the can has a volume of 350 mL. If the can is left in a car that reaches 50 °C on a hot day, what is the new pressure in the can?

Solution

a. The can contains an amount of isobutane gas at a constant volume, so if the temperature is increased by heating, the pressure will increase proportionately. High temperature could lead to high pressure, causing the can to burst. (Also, isobutane is combustible, so incineration could cause the can to explode.)
b. We are looking for a pressure change due to a temperature change at constant volume, so we will use Amontons's/Gay-Lussac's law. Taking P_1 and T_1 as the initial values, T_2 as the temperature where the pressure is unknown and P_2 as the unknown pressure, and converting °C to K, we have:

$$\frac{P_1}{T_1} = \frac{P_2}{T_2} \text{ which means that } \frac{360\ k\text{Pa}}{297\ \text{K}} = \frac{P_2}{323\ \text{K}}$$

Rearranging and solving gives:

$$P_2 = \frac{360\ \text{kPa} \times 323\ \cancel{\text{K}}}{297\ \cancel{\text{K}}} = 390\ \text{kPa}$$

Exercise 8.2.1

A sample of nitrogen, N_2, occupies 45.0 mL at 27 °C and 600 torr. What pressure will it have if cooled to –73 °C while the volume remains constant?

Answer

400 torr

Volume and Temperature: Charles's Law

If we fill a balloon with air and seal it, the balloon contains a specific amount of air at atmospheric pressure, let's say 1 atm. If we put the balloon in a refrigerator, the gas inside gets cold and the balloon shrinks (although both the amount of gas and its pressure remain constant). If we make the balloon very cold, it will shrink a great deal, and it expands again when it warms up.

Video **8.2.1**: This video shows how cooling and heating a gas causes its volume to decrease or increase, respectively.

These examples of the effect of temperature on the volume of a given amount of a confined gas at constant pressure are true in general: The volume increases as the temperature increases, and decreases as the temperature decreases. Volume-temperature data for a 1-mole sample of methane gas at 1 atm are listed and graphed in Figure **8.2.2**.

Temperature (°C)	Temperature (K)	Volume (L)
−3	270	22
−23	250	21
−53	220	18
−162	111	9

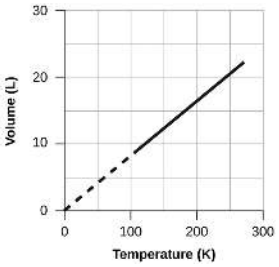

Figure **8.2.4**: The volume and temperature are linearly related for 1 mole of methane gas at a constant pressure of 1 atm. If the temperature is in kelvin, volume and temperature are directly proportional. The line stops at 111 K because methane liquefies at this temperature; when extrapolated, it intersects the graph's origin, representing a temperature of absolute zero.

This figure includes a table and a graph. The table has 3 columns and 6 rows. The first row is a header, which labels the columns "Temperature, degrees C," "Temperature, K," and "Pressure, k P a." The first column contains the values from top to bottom negative 100, negative 50, 0, 100, and 200. The second column contains the values from top to bottom 173, 223, 273, 373, and 473. The third column contains the values 14.10, 18.26, 22.40, 30.65, and 38.88. A graph appears to the right of the table. The horizontal axis is labeled "Temperature (K)." with markings and labels provided for multiples of 100 beginning at 0 and ending at 300. The vertical axis is labeled "Volume (L)" with marking and labels provided for multiples of 10, beginning at 0 and ending at 30. Five data points from the table are plotted on the graph with black dots. These dots are connected with a solid black line. The graph shows a positive linear trend.

The relationship between the volume and temperature of a given amount of gas at constant pressure is known as Charles's law in recognition of the French scientist and balloon flight pioneer Jacques Alexandre César Charles. Charles's law states that *the volume of a given amount of gas is directly proportional to its temperature on the kelvin scale when the pressure is held constant*.

Mathematically, this can be written as:

$$V \alpha T \text{ or } V = \text{constant} \cdot T \text{ or } V = k \cdot T$$

with k being a proportionality constant that depends on the amount and pressure of the gas.

For a confined, constant pressure gas sample, $\frac{V}{T}$ is constant (i.e., the ratio = k), and as seen with the P-T relationship, this leads to another form of Charles's law: $\frac{V_1}{T_1} = \frac{V_2}{T_2}$.

Example 8.2.2: Predicting Change in Volume with Temperature

A sample of carbon dioxide, CO_2, occupies 0.300 L at 10 °C and 750 torr. What volume will the gas have at 30 °C and 750 torr?

Solution

Because we are looking for the volume change caused by a temperature change at constant pressure, this is a job for Charles's law. Taking V_1 and T_1 as the initial values, T_2 as the temperature at which the volume is unknown and V_2 as the unknown volume, and converting °C into K we have:

$$\frac{V_1}{T_1} = \frac{V_2}{T_2} \text{ which means that } \frac{0.300\ \text{L}}{283\ \text{K}} = \frac{V_2}{303\ \text{K}}$$

Rearranging and solving gives: $V_2 = \frac{0.300\ \text{L} \times 303\ \cancel{\text{K}}}{283\ \cancel{\text{K}}} = 0.321\ \text{L}$

This answer supports our expectation from Charles's law, namely, that raising the gas temperature (from 283 K to 303 K) at a constant pressure will yield an increase in its volume (from 0.300 L to 0.321 L).

Exercise 8.2.2

A sample of oxygen, O_2, occupies 32.2 mL at 30 °C and 452 torr. What volume will it occupy at –70 °C and the same pressure?

Answer

21.6 mL

Example 8.2.3: Measuring Temperature with a Volume

Change Temperature is sometimes measured with a gas thermometer by observing the change in the volume of the gas as the temperature changes at constant pressure. The hydrogen in a particular hydrogen gas thermometer has a volume of 150.0 cm^3 when immersed in a mixture of ice and water (0.00 °C). When immersed in boiling liquid ammonia, the volume of the hydrogen, at the same pressure, is 131.7 cm^3. Find the temperature of boiling ammonia on the kelvin and Celsius scales.

Solution

A volume change caused by a temperature change at constant pressure means we should use Charles's law. Taking V_1 and T_1 as the initial values, T_2 as the temperature at which the volume is unknown and V_2 as the unknown volume, and converting °C into K we have:

$$\frac{V_1}{T_1} = \frac{V_2}{T_2} \text{ which means that } \frac{150.0\ \text{cm}^3}{273.15\ \text{K}} = \frac{131.7\ \text{cm}^3}{T_2}$$

Rearrangement gives $T_2 = \frac{131.7\ \cancel{\text{cm}^3} \times 273.15\ \text{K}}{150.0\ \text{cm}^3} = 239.8\ \text{K}$

Subtracting 273.15 from 239.8 K, we find that the temperature of the boiling ammonia on the Celsius scale is –33.4 °C.

Exercise 8.2.3

What is the volume of a sample of ethane at 467 K and 1.1 atm if it occupies 405 mL at 298 K and 1.1 atm?

Answer

635 mL

Volume and Pressure: Boyle's Law

If we partially fill an airtight syringe with air, the syringe contains a specific amount of air at constant temperature, say 25 °C. If we slowly push in the plunger while keeping temperature constant, the gas in the syringe is compressed into a smaller volume and its pressure increases; if we pull out the plunger, the volume increases and the pressure decreases. This example of the effect of volume on the pressure of a given amount of a confined gas is true in general. Decreasing the volume of a contained gas will increase its pressure, and increasing its volume will decrease its

pressure. In fact, if the volume increases by a certain factor, the pressure decreases by the same factor, and vice versa. Volume-pressure data for an air sample at room temperature are graphed in Figure **8.2.5**.

Figure **8.2.5**: When a gas occupies a smaller volume, it exerts a higher pressure; when it occupies a larger volume, it exerts a lower pressure (assuming the amount of gas and the temperature do not change). Since P and V are inversely proportional, a graph of $\frac{1}{P}$ vs. V is linear.

This figure contains a diagram and two graphs. The diagram shows a syringe labeled with a scale in m l or c c with multiples of 5 labeled beginning at 5 and ending at 30. The markings halfway between these measurements are also provided. Attached at the top of the syringe is a pressure gauge with a scale marked by fives from 40 on the left to 5 on the right. The gauge needle rests between 10 and 15, slightly closer to 15. The syringe plunger position indicates a volume measurement about halfway between 10 and 15 m l or c c. The first graph is labeled “V (m L)” on the horizontal axis and “P (p s i)” on the vertical axis. Points are labeled at 5, 10, 15, 20, and 25 m L with corresponding values of 39.0, 19.5, 13.0, 9.8, and 6.5 p s i. The points are connected with a smooth curve that is declining at a decreasing rate of change. The second graph is labeled “V (m L)” on the horizontal axis and “1 divided by P (p s i)” on the vertical axis. The horizontal axis is labeled at multiples of 5, beginning at zero and extending up to 35 m L. The vertical axis is labeled by multiples of 0.02, beginning at 0 and extending up to 0.18. Six points indicated by black dots on this graph are connected with a black line segment showing a positive linear trend.

Unlike the *P*-*T* and *V*-*T* relationships, pressure and volume are not directly proportional to each other. Instead, P and V exhibit inverse proportionality: Increasing the pressure results in a decrease of the volume of the gas. Mathematically this can be written:

$$P \propto \frac{1}{V}$$

or

$$P = k \cdot \frac{1}{V}$$

or

$$PV = k$$

or

$$P_1V_1 = P_2V_2$$

with k being a constant. Graphically, this relationship is shown by the straight line that results when plotting the inverse of the pressure $\left(\frac{1}{P}\right)$ versus the volume (V), or the inverse of volume $\left(\frac{1}{V}\right)$ versus the pressure (P). Graphs with curved lines are difficult to read accurately at low or high values of the variables, and they are more difficult to use in fitting theoretical equations and parameters to experimental data. For those reasons, scientists often try to find a way to “linearize” their data. If we plot P versus V, we obtain a hyperbola (Figure **8.2.6**).

Figure **8.2.6**: The relationship between pressure and volume is inversely proportional. (a) The graph of P vs. V is a hyperbola, whereas (b) the graph of $\left(\frac{1}{P}\right)$ vs. V is linear.

This diagram shows two graphs. In a, a graph is shown with volume on the horizontal axis and pressure on the vertical axis. A curved line is shown on the graph showing a decreasing trend with a decreasing rate of change. In b, a graph is shown with volume on the horizontal axis and one divided by pressure on the vertical axis. A line segment, beginning at the origin of the graph, shows a positive, linear trend.

The relationship between the volume and pressure of a given amount of gas at constant temperature was first published by the English natural philosopher Robert Boyle over 300 years ago. It is summarized in the statement now known as **Boyle’s law**: *The volume of a given amount of gas held at constant temperature is inversely proportional to the pressure under which it is measured.*

Example 8.2.4: Volume of a Gas Sample

The sample of gas has a volume of 15.0 mL at a pressure of 13.0 psi. Determine the pressure of the gas at a volume of 7.5 mL, using:

a. the *P*-*V* graph in Figure **8.2.6***a*
b. the $\frac{1}{P}$ vs. V graph in Figure **8.2.6***b*
c. the Boyle’s law equation

Comment on the likely accuracy of each method.

Solution

a. Estimating from the *P*-*V* graph gives a value for P somewhere around 27 psi.
b. Estimating from the $\frac{1}{P}$ versus V graph give a value of about 26 psi.
c. From Boyle’s law, we know that the product of pressure and volume (PV) for a given sample of gas at a constant temperature is always equal to the same value. Therefore we have $P_1V_1 = k$ and $P_2V_2 = k$ which means that $P_1V_1 = P_2V_2$.

Using P_1 and V_1 as the known values 13.0 psi and 15.0 mL, P_2 as the pressure at which the volume is unknown, and V_2 as the unknown volume, we have:

$$P_1V_1 = P_2V_2 \text{ or } 13.0 \text{ psi} \times 15.0 \text{ mL} = P_2 \times 7.5 \text{ mL}$$

Solving:

$$P_2 = \frac{13.0 \text{ psi} \times 15.0 \cancel{\text{mL}}}{7.5 \cancel{\text{mL}}} = 26 \text{ psi}$$

It was more difficult to estimate well from the *P*-*V* graph, so (a) is likely more inaccurate than (b) or (c). The calculation will be as accurate as the equation and measurements allow.

Exercise 8.2.4

The sample of gas has a volume of 30.0 mL at a pressure of 6.5 psi. Determine the volume of the gas at a pressure of 11.0 psi, using:

a. the *P*-*V* graph in Figure **8.2.6***a*
b. the $\frac{1}{P}$ vs. V graph in Figure **8.2.6***b*
c. the Boyle’s law equation

Comment on the likely accuracy of each method.

Answer a

about 17–18 mL

Answer b

~18 mL

Answer c

17.7 mL; it was more difficult to estimate well from the *P*-*V* graph, so (a) is likely more inaccurate than (b); the calculation will be as accurate as the equation and measurements allow

Breathing and Boyle's Law

What do you do about 20 times per minute for your whole life, without break, and often without even being aware of it? The answer, of course, is respiration, or breathing. How does it work? It turns out that the gas laws apply here. Your lungs take in gas that your body needs (oxygen) and get rid of waste gas (carbon dioxide). Lungs are made of spongy, stretchy tissue that expands and contracts while you breathe. When you inhale, your diaphragm and intercostal muscles (the muscles between your ribs) contract, expanding your chest cavity and making your lung volume larger. The increase in volume leads to a decrease in pressure (Boyle's law). This causes air to flow into the lungs (from high pressure to low pressure). When you exhale, the process reverses: Your diaphragm and rib muscles relax, your chest cavity contracts, and your lung volume decreases, causing the pressure to increase (Boyle's law again), and air flows out of the lungs (from high pressure to low pressure). You then breathe in and out again, and again, repeating this Boyle's law cycle for the rest of your life (Figure **8.2.7**).

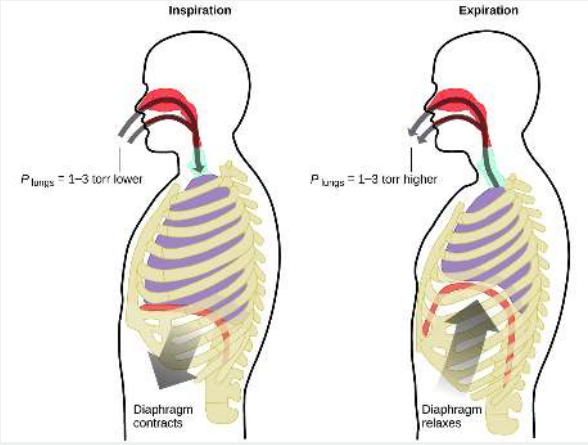

Figure **8.2.7**: Breathing occurs because expanding and contracting lung volume creates small pressure differences between your lungs and your surroundings, causing air to be drawn into and forced out of your lungs.

This figure contains two diagrams of a cross section of the human head and torso. The first diagram on the left is labeled "Inspiration." It shows curved arrows in gray proceeding through the nasal passages and mouth to the lungs. An arrow points downward from the diaphragm, which is relatively flat, just beneath the lungs. This arrow is labeled "Diaphragm contracts." At the entrance to the mouth and nasal passages, a label of P subscript lungs equals 1 dash 3 torr lower" is provided. The second, similar diagram, which is labeled "Expiration," reverses the direction of both arrows. Arrows extend from the lungs out through the nasal passages and mouth. Similarly, an arrow points up to the diaphragm, showing a curved diaphragm and lungs reduced in size from the previous image. This arrow is labeled "Diaphragm relaxes." At the entrance to the mouth and nasal passages, a label of P subscript lungs equals 1 dash 3 torr higher" is provided.

Moles of Gas and Volume: Avogadro's Law

The Italian scientist Amedeo Avogadro advanced a hypothesis in 1811 to account for the behavior of gases, stating that equal volumes of all gases, measured under the same conditions of temperature and pressure, contain the same number of molecules. Over time, this relationship was supported by many experimental observations as expressed by Avogadro's law: *For a confined gas, the volume (V) and number of moles (n) are directly proportional if the pressure and temperature both remain constant*.

In equation form, this is written as:

$$V \propto n \text{ or } V = k \times n \text{ or } \frac{V_1}{n_1} = \frac{V_2}{n_2}$$

Mathematical relationships can also be determined for the other variable pairs, such as P versus n, and n versus T.

> *Visit this interactive PhET simulation to investigate the relationships between pressure, volume, temperature, and amount of gas. Use the simulation to examine the effect of changing one parameter on another while holding the other parameters constant (as described in the preceding sections on the various gas laws).*

The Ideal Gas Law

To this point, four separate laws have been discussed that relate pressure, volume, temperature, and the number of moles of the gas:

- Boyle's law: PV = constant at constant T and n
- Amontons's law: $\frac{P}{T}$ = constant at constant V and n
- Charles's law: $\frac{V}{T}$ = constant at constant P and n
- Avogadro's law: $\frac{V}{n}$ = constant at constant P and T

Combining these four laws yields the ideal gas law, a relation between the pressure, volume, temperature, and number of moles of a gas:

$$PV = nRT$$

where P is the pressure of a gas, V is its volume, n is the number of moles of the gas, T is its temperature on the kelvin scale, and R is a constant called the ideal gas constant or the universal gas constant. The units used to express pressure, volume, and temperature will determine the proper form of the gas constant as required by dimensional analysis, the most commonly encountered values being 0.08206 L atm mol^{-1} K^{-1} and 8.3145 kPa L mol^{-1} K^{-1}.

> *The ideal gas law is easy to remember and apply in solving problems, as long as you use the* ***proper values*** *and units for the gas constant, R.*

Gases whose properties of P, V, and T are accurately described by the ideal gas law (or the other gas laws) are said to exhibit *ideal behavior* or to approximate the traits of an ideal gas. An ideal gas is a hypothetical construct that may be used along with *kinetic molecular theory* to effectively explain the gas laws as will be described in a later module of this chapter. Although all the calculations presented in this module assume ideal behavior, this assumption is only reasonable for gases under conditions of relatively low pressure and high temperature. In the final module of this chapter, a modified gas law will be introduced that accounts for the *non-ideal* behavior observed for many gases at relatively high pressures and low temperatures.

The ideal gas equation contains five terms, the gas constant R and the variable properties P, V, n, and T. Specifying any four of these terms will permit use of the ideal gas law to calculate the fifth term as demonstrated in the following example exercises.

Example 8.2.5: Using the Ideal Gas Law

Methane, CH_4, is being considered for use as an alternative automotive fuel to replace gasoline. One gallon of gasoline could be replaced by 655 g of CH_4. What is the volume of this much methane at 25 °C and 745 torr?

Solution

Exercise 8.2.5

Calculate the pressure in bar of 2520 moles of hydrogen gas stored at 27 °C in the 180-L storage tank of a modern hydrogen-powered car.

Answer

350 bar

If the number of moles of an ideal gas are kept constant under two different sets of conditions, a useful mathematical relationship called the combined gas law is obtained: $\frac{P_1V_1}{T_1} = \frac{P_2V_2}{T_2}$ using units of atm, L, and K. Both sets of conditions are equal to the product of $n \times R$ (where n = the number of moles of the gas and R is the ideal gas law constant).

Example 8.2.6: Using the Combined Gas Law

When filled with air, a typical scuba tank with a volume of 13.2 L has a pressure of 153 atm (Figure **8.2.8**). If the water temperature is 27 °C, how many liters of air will such a tank provide to a diver's lungs at a depth of approximately 70 feet in the ocean where the pressure is 3.13 atm?

Figure **8.2.8**: Scuba divers use compressed air to breathe while underwater. (credit: modification of work by Mark Goodchild)

This photograph shows a scuba diver underwater with a tank on his or her back and bubbles ascending from the breathing apparatus.

Letting *1* represent the air in the scuba tank and *2* represent the air in the lungs, and noting that body temperature (the temperature the air will be in the lungs) is 37 °C, we have:

$$\frac{P_1V_1}{T_1} = \frac{P_2V_2}{T_2} \longrightarrow \frac{(153\ \text{atm})(13.2\ \text{L})}{(300\ \text{K})} = \frac{(3.13\ \text{atm})(V_2)}{(310\ \text{K})}$$

Solving for V_2:

$$V_2 = \frac{(153\ \cancel{\text{atm}})(13.2\ \text{L})(310\ \cancel{\text{K}})}{(300\ \cancel{\text{K}})(3.13\ \cancel{\text{atm}})} = 667\ \text{L}$$

(Note: Be advised that this particular example is one in which the assumption of ideal gas behavior is not very reasonable, since it involves gases at relatively high pressures and low temperatures. Despite this limitation, the calculated volume can be viewed as a good "ballpark" estimate.)

Exercise 8.2.6

A sample of ammonia is found to occupy 0.250 L under laboratory conditions of 27 °C and 0.850 atm. Find the volume of this sample at 0 °C and 1.00 atm.

Answer

0.193 L

The Interdependence between Ocean Depth and Pressure in Scuba Diving

Whether scuba diving at the Great Barrier Reef in Australia (shown in Figure **8.2.9**) or in the Caribbean, divers must understand how pressure affects a number of issues related to their comfort and safety.

Figure **8.2.9**: Scuba divers, whether at the Great Barrier Reef or in the Caribbean, must be aware of buoyancy, pressure equalization, and the amount of time they spend underwater, to avoid the risks associated with pressurized gases in the body. (credit: Kyle Taylor).

This picture shows colorful underwater corals and anemones in hues of yellow, orange, green, and brown, surrounded by water that appears blue in color.

Pressure increases with ocean depth, and the pressure changes most rapidly as divers reach the surface. The pressure a diver experiences is the sum of all pressures above the diver (from the water and the air). Most pressure measurements are given in units of atmospheres, expressed as "atmospheres absolute" or ATA in the diving community: Every 33 feet of salt water represents 1 ATA of pressure in addition to 1 ATA of pressure from the atmosphere at sea level. As a diver descends, the increase in pressure causes the body's air pockets in the ears and lungs to compress; on the ascent, the decrease in pressure causes these air pockets to expand, potentially rupturing eardrums or bursting the lungs. Divers must therefore undergo equalization by adding air to body

airspaces on the descent by breathing normally and adding air to the mask by breathing out of the nose or adding air to the ears and sinuses by equalization techniques; the corollary is also true on ascent, divers must release air from the body to maintain equalization. Buoyancy, or the ability to control whether a diver sinks or floats, is controlled by the buoyancy compensator (BCD). If a diver is ascending, the air in his BCD expands because of lower pressure according to Boyle's law (decreasing the pressure of gases increases the volume). The expanding air increases the buoyancy of the diver, and she or he begins to ascend. The diver must vent air from the BCD or risk an uncontrolled ascent that could rupture the lungs. In descending, the increased pressure causes the air in the BCD to compress and the diver sinks much more quickly; the diver must add air to the BCD or risk an uncontrolled descent, facing much higher pressures near the ocean floor. The pressure also impacts how long a diver can stay underwater before ascending. The deeper a diver dives, the more compressed the air that is breathed because of increased pressure: If a diver dives 33 feet, the pressure is 2 ATA and the air would be compressed to one-half of its original volume. The diver uses up available air twice as fast as at the surface.

Standard Conditions of Temperature and Pressure

We have seen that the volume of a given quantity of gas and the number of molecules (moles) in a given volume of gas vary with changes in pressure and temperature. Chemists sometimes make comparisons against a standard temperature and pressure (STP) for reporting properties of gases: 273.15 K (0.00 °C) and 1 atm (101.325 kPa). At STP, an ideal gas has a volume of about 22.4 L—this is referred to as the standard molar volume (Figure **8.2.10**).

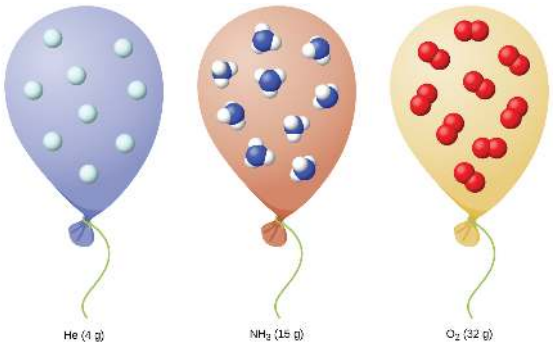

Figure **8.2.10**: Since the number of moles in a given volume of gas varies with pressure and temperature changes, chemists use standard temperature and pressure (273.15 K and 1 atm or 101.325 kPa) to report properties of gases.

This figure shows three balloons each filled with H e, N H subscript 2, and O subscript 2 respectively. Beneath the first balloon is the label "4 g of He" Beneath the second balloon is the label, "15 g of N H subscript 2." Beneath the third balloon is the label "32 g of O subscript 2." Each balloon contains the same number of molecules of their respective gases.

Summary

The behavior of gases can be described by several laws based on experimental observations of their properties. The pressure of a given amount of gas is directly proportional to its absolute temperature, provided that the volume does not change (Amontons's law). The volume of a given gas sample is directly proportional to its absolute temperature at constant pressure (Charles's law). The volume of a given amount of gas is inversely proportional to its pressure when temperature is held constant (Boyle's law). Under the same conditions of temperature and pressure, equal volumes of all gases contain the same number of molecules (Avogadro's law).

The equations describing these laws are special cases of the ideal gas law, $PV = nRT$, where P is the pressure of the gas, V is its volume, n is the number of moles of the gas, T is its kelvin temperature, and R is the ideal (universal) gas constant.

Key Equations

- $PV = nRT$

Summary

absolute zero
temperature at which the volume of a gas would be zero according to Charles's law.

Amontons's law
(also, Gay-Lussac's law) pressure of a given number of moles of gas is directly proportional to its kelvin temperature when the volume is held constant

Avogadro's law
volume of a gas at constant temperature and pressure is proportional to the number of gas molecules

Boyle's law
volume of a given number of moles of gas held at constant temperature is inversely proportional to the pressure under which it is measured

Charles's law
volume of a given number of moles of gas is directly proportional to its kelvin temperature when the pressure is held constant

ideal gas
hypothetical gas whose physical properties are perfectly described by the gas laws

ideal gas constant (*R*)
constant derived from the ideal gas equation $R = 0.08226$ L atm mol^{-1} K^{-1} or 8.314 L kPa mol^{-1} K^{-1}

ideal gas law
relation between the pressure, volume, amount, and temperature of a gas under conditions derived by combination of the simple gas laws

standard conditions of temperature and pressure (STP)
273.15 K (0 °C) and 1 atm (101.325 kPa)

standard molar volume
volume of 1 mole of gas at STP, approximately 22.4 L for gases behaving ideally

This page titled 8.2: The Ideal Gas Law is shared under a CC BY license and was authored, remixed, and/or curated by OpenStax.

- **9.2: Relating Pressure, Volume, Amount, and Temperature - The Ideal Gas Law** by OpenStax is licensed CC BY 4.0. Original source: https://openstax.org/details/books/chemistry-2e.

https://chem.libretexts.org/@go/page/162483

https://chem.libretexts.org/@go/page/162483

https://chem.libretexts.org/@go/page/162483

https://chem.libretexts.org/@go/page/162483

8.3: Stoichiometry of Gaseous Substances, Mixtures, and Reactions

Learning Objectives

- Use the ideal gas law to compute gas densities and molar masses
- Perform stoichiometric calculations involving gaseous substances
- State Dalton's law of partial pressures and use it in calculations involving gaseous mixtures

The study of the chemical behavior of gases was part of the basis of perhaps the most fundamental chemical revolution in history. French nobleman Antoine Lavoisier, widely regarded as the "father of modern chemistry," changed chemistry from a qualitative to a quantitative science through his work with gases. He discovered the law of conservation of matter, discovered the role of oxygen in combustion reactions, determined the composition of air, explained respiration in terms of chemical reactions, and more. He was a casualty of the French Revolution, guillotined in 1794. Of his death, mathematician and astronomer Joseph-Louis Lagrange said, "It took the mob only a moment to remove his head; a century will not suffice to reproduce it."

As described in an earlier chapter of this text, we can turn to chemical stoichiometry for answers to many of the questions that ask "How much?" We can answer the question with masses of substances or volumes of solutions. However, we can also answer this question another way: with volumes of gases. We can use the ideal gas equation to relate the pressure, volume, temperature, and number of moles of a gas. Here we will combine the ideal gas equation with other equations to find gas density and molar mass. We will deal with mixtures of different gases, and calculate amounts of substances in reactions involving gases. This section will not introduce any new material or ideas, but will provide examples of applications and ways to integrate concepts we have already discussed.

Density of a Gas

Recall that the density of a gas is its mass to volume ratio, $\rho = \frac{m}{V}$. Therefore, if we can determine the mass of some volume of a gas, we will get its density. The density of an unknown gas can used to determine its molar mass and thereby assist in its identification. The ideal gas law, $PV = nRT$, provides us with a means of deriving such a mathematical formula to relate the density of a gas to its volume in the proof shown in Example **8.3.1**.

Example 8.3.1: Derivation of a Density Formula from the Ideal Gas Law

Use $PV = nRT$ to derive a formula for the density of gas in g/L

Solution

$$PV = nRT$$

Rearrange to get (mol/L):

$$\frac{n}{v} = \frac{P}{RT}$$

Multiply each side of the equation by the molar mass, $\mathcal{M}$. When moles are multiplied by $\mathcal{M}$ in g/mol, g are obtained:

$$(\mathcal{M})\left(\frac{n}{V}\right) = \left(\frac{P}{RT}\right)(\mathcal{M})$$

$$\mathcal{M}/V = \rho = \frac{P\mathcal{M}}{RT}$$

Exercise 8.3.1

A gas was found to have a density of 0.0847 g/L at 17.0 °C and a pressure of 760 torr. What is its molar mass? What is the gas?

Answer

$$\rho = \frac{P\mathcal{M}}{RT}$$

$$0.0847\ \text{g/L} = 760\ \cancel{\text{torr}} \times \frac{1\ \cancel{\text{atm}}}{760\ \cancel{\text{torr}}} \times \frac{\mathcal{M}}{0.0821\ \text{L}\ \cancel{\text{atm}}/\text{mol K}} \times 290\ \text{K}$$

$\mathcal{M}$ = 2.02 g/mol; therefore, the gas must be hydrogen (H_2, 2.02 g/mol)

We must specify both the temperature and the pressure of a gas when calculating its density because the number of moles of a gas (and thus the mass of the gas) in a liter changes with temperature or pressure. Gas densities are often reported at STP.

Example 8.3.2: Empirical/Molecular Formula Problems

Using the Ideal Gas Law and Density of a Gas Cyclopropane, a gas once used with oxygen as a general anesthetic, is composed of 85.7% carbon and 14.3% hydrogen by mass. Find the empirical formula. If 1.56 g of cyclopropane occupies a volume of 1.00 L at 0.984 atm and 50 °C, what is the molecular formula for cyclopropane?

Solution

Strategy:

First solve the empirical formula problem using methods discussed earlier. Assume 100 g and convert the percentage of each element into grams. Determine the number of moles of carbon and hydrogen in the 100-g sample of cyclopropane. Divide by the smallest number of moles to relate the number of moles of carbon to the number of moles of hydrogen. In the last step, realize that the smallest whole number ratio is the empirical formula:

$$85.7\ \text{g C} \times \frac{1\ \text{mol C}}{12.01\ \text{g C}} = 7.136\ \text{mol C} \quad \frac{7.136}{7.136} = 1.00\ \text{mol C}$$

$$14.3\ \text{g H} \times \frac{1\ \text{mol H}}{1.01\ \text{g H}} = 14.158\ \text{mol H} \quad \frac{14.158}{7.136} = 1.98\ \text{mol H}$$

Empirical formula is CH_2 [empirical mass (EM) of 14.03 g/empirical unit].

Next, use the density equation related to the ideal gas law to determine the molar mass:

$$d = \frac{P\mathcal{M}}{RT} \quad \frac{1.56\ \text{g}}{1.00\ \text{L}} = 0.984\ \text{atm} \times \frac{\mathcal{M}}{0.0821\ \text{L atm/mol K}} \times 323\ \text{K}$$

$\mathcal{M}$ = 42.0 g/mol, $\frac{\mathcal{M}}{E\mathcal{M}} = \frac{42.0}{14.03} = 2.99$, so (3)($CH_2$) = C_3H_6 (molecular formula)

Exercise 8.3.2

Acetylene, a fuel used welding torches, is comprised of 92.3% C and 7.7% H by mass. Find the empirical formula. If 1.10 g of acetylene occupies of volume of 1.00 L at 1.15 atm and 59.5 °C, what is the molecular formula for acetylene?

Answer

Empirical formula, CH; Molecular formula, C_2H_2

Molar Mass of a Gas

Another useful application of the ideal gas law involves the determination of molar mass. By definition, the molar mass of a substance is the ratio of its mass in grams, *m*, to its amount in moles, *n*:

$$\mathcal{M} = \frac{\text{grams of substance}}{\text{moles of substance}} = \frac{m}{n}$$

The ideal gas equation can be rearranged to isolate n:

$$n = \frac{PV}{RT}$$

and then combined with the molar mass equation to yield:

$$\mathcal{M} = \frac{mRT}{PV}$$

This equation can be used to derive the molar mass of a gas from measurements of its pressure, volume, temperature, and mass.

Example 8.3.3: Determining the Molar Mass of a Volatile Liquid

The approximate molar mass of a volatile liquid can be determined by:

1. Heating a sample of the liquid in a flask with a tiny hole at the top, which converts the liquid into gas that may escape through the hole
2. Removing the flask from heat at the instant when the last bit of liquid becomes gas, at which time the flask will be filled with only gaseous sample at ambient pressure
3. Sealing the flask and permitting the gaseous sample to condense to liquid, and then weighing the flask to determine the sample's mass (Figure **8.3.1**)



Figure **8.3.1**: When the volatile liquid in the flask is heated past its boiling point, it becomes gas and drives air out of the flask. At $t_{l \longrightarrow g}$, *the flask is filled with volatile liquid gas at the same pressure as the atmosphere. If the flask is then cooled to room temperature, the gas condenses and the mass of the gas that filled the flask, and is now liquid, can be measured. (credit: modification of work by Mark Ott)*

Using this procedure, a sample of chloroform gas weighing 0.494 g is collected in a flask with a volume of 129 cm^3 at 99.6 °C when the atmospheric pressure is 742.1 mm Hg. What is the approximate molar mass of chloroform?

Solution

Since

$$\mathcal{M} = \frac{m}{n}$$

and

$$n = \frac{PV}{RT}$$

substituting and rearranging gives

$$\mathcal{M} = \frac{mRT}{PV}$$

then

$$\mathcal{M} = \frac{mRT}{PV} = \frac{(0.494\ \text{g}) \times 0.08206\ \text{L} \cdot \text{atm/mol K} \times 372.8\ \text{K}}{0.976\ \text{atm} \times 0.129\ \text{L}} = 120\ \text{g/mol}$$

Exercise 8.3.3

A sample of phosphorus that weighs 3.243×10^{-2} g exerts a pressure of 31.89 kPa in a 56.0-mL bulb at 550 °C. What are the molar mass and molecular formula of phosphorus vapor?

Answer

124 g/mol P_4

The Pressure of a Mixture of Gases: Dalton's Law

Unless they chemically react with each other, the individual gases in a mixture of gases do not affect each other's pressure. Each individual gas in a mixture exerts the same pressure that it would exert if it were present alone in the container (Figure 8.3.2). The pressure exerted by each individual gas in a mixture is called its partial pressure. This observation is summarized by Dalton's law of partial pressures: *The total pressure of a mixture of ideal gases is equal to the sum of the partial pressures of the component gases*:

$$P_{Total} = P_A + P_B + P_C + ... = \sum_i P_i$$

In the equation P_{Total} is the total pressure of a mixture of gases, P_A is the partial pressure of gas A; P_B is the partial pressure of gas B; P_C is the partial pressure of gas C; and so on.

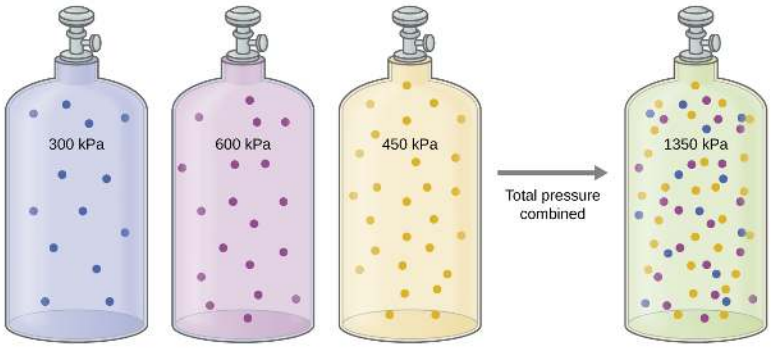

Figure 8.3.2: If equal-volume cylinders containing gas A at a pressure of 300 kPa, gas B at a pressure of 600 kPa, and gas C at a pressure of 450 kPa are all combined in the same-size cylinder, the total pressure of the mixture is 1350 kPa.

This figure includes images of four gas-filled cylinders or tanks. Each has a valve at the top. The interior of the first cylinder is shaded blue. This region contains 5 small blue circles that are evenly distributed. The label "300 k P a" is on the cylinder. The second cylinder is shaded lavender. This region contains 8 small purple circles that are evenly distributed. The label "600 k P a" is on the cylinder. To the right of these cylinders is a third cylinder. Its interior is shaded pale yellow. This region contains 12 small yellow circles that are evenly distributed. The label "450 k P a" is on this region of the cylinder. An arrow labeled "Total pressure combined" appears to the right of these three cylinders. This arrow points to a fourth cylinder. The interior of this cylinder is shaded a pale green. It contains evenly distributed small circles in the following quantities and colors; 5 blue, 8 purple, and 12 yellow. This cylinder is labeled "1350 k P a."

The partial pressure of gas A is related to the total pressure of the gas mixture via its mole fraction (X), a unit of concentration defined as the number of moles of a component of a solution divided by the total number of moles of all components:

$$P_A = X_A \times P_{Total} \quad \text{where} \quad X_A = \frac{n_A}{n_{Total}}$$

where P_A, X_A, and n_A are the partial pressure, mole fraction, and number of moles of gas A, respectively, and n_{Total} is the number of moles of all components in the mixture.

Example 8.3.2: The Pressure of a Mixture of Gases

A 10.0-L vessel contains 2.50×10^{-3} mol of H_2, 1.00×10^{-3} mol of He, and 3.00×10^{-4} mol of Ne at 35 °C.

a. What are the partial pressures of each of the gases?
b. What is the total pressure in atmospheres?

Solution

The gases behave independently, so the partial pressure of each gas can be determined from the ideal gas equation, using $P = \frac{nRT}{V}$:

$$P_{H_2} = \frac{(2.50 \times 10^{-3}\ \text{mol})(0.08206\ \cancel{L}\ \cancel{\text{atm mol}^{-1}\ \text{K}^{-1}})(308\ \cancel{K})}{10.0\ \cancel{L}} = 6.32 \times 10^{-3}\ \text{atm}$$

$$P_{He} = \frac{(1.00 \times 10^{-3}\ \cancel{\text{mol}})(0.08206\ \cancel{L}\ \cancel{\text{atm mol}^{-1}\ \text{K}^{-1}})(308\ \cancel{K})}{10.0\ \cancel{L}} = 2.53 \times 10^{-3}\ \text{atm}$$

$$P_{Ne} = \frac{(3.00 \times 10^{-4}\ \cancel{\text{mol}})(0.08206\ \cancel{L}\ \cancel{\text{atm mol}^{-1}\ \text{K}^{-1}})(308\ \cancel{K})}{10.0\ \cancel{L}} = 7.58 \times 10^{-4}\ \text{atm}$$

The total pressure is given by the sum of the partial pressures:

$$P_T = P_{H_2} + P_{He} + P_{Ne} = (0.00632 + 0.00253 + 0.00076)\ \text{atm} = 9.61 \times 10^{-3}\ \text{atm}$$

Exercise 8.3.2

A 5.73-L flask at 25 °C contains 0.0388 mol of N_2, 0.147 mol of CO, and 0.0803 mol of H_2. What is the total pressure in the flask in atmospheres?

Answer

1.137 atm

Here is another example of this concept, but dealing with mole fraction calculations.

Example 8.3.3: The Pressure of a Mixture of Gases

A gas mixture used for anesthesia contains 2.83 mol oxygen, O_2, and 8.41 mol nitrous oxide, N_2O. The total pressure of the mixture is 192 kPa.

a. What are the mole fractions of O_2 and N_2O?
b. What are the partial pressures of O_2 and N_2O?

Solution

The mole fraction is given by

$$X_A = \frac{n_A}{n_{Total}}$$

and the partial pressure is

$$P_A = X_A \times P_{Total}$$

For O_2,

$$X_{O_2} = \frac{n_{O_2}}{n_{Total}} = \frac{2.83\text{mol}}{(2.83 + 8.41)\ \text{mol}} = 0.252$$

and

$$P_{O_2} = X_{O_2} \times P_{Total} = 0.252 \times 192\ \text{kPa} = 48.4\ \text{kPa}$$

For N_2O,

$$X_{N_2O} = \frac{n_{N_2O}}{n_{Total}} = \frac{8.41\ \text{mol}}{(2.83 + 8.41)\ \text{mol}} = 0.748$$

and

$$P_{N_2O} = X_{N_2O} \times P_{Total} = (0.748) \times 192\ \text{kPa} = 143.6\ \text{kPa}$$

? Exercise 8.3.3

What is the pressure of a mixture of 0.200 g of H_2, 1.00 g of N_2, and 0.820 g of Ar in a container with a volume of 2.00 L at 20 °C?

Answer

1.87 atm

Collection of Gases over Water

A simple way to collect gases that do not react with water is to capture them in a bottle that has been filled with water and inverted into a dish filled with water. The pressure of the gas inside the bottle can be made equal to the air pressure outside by raising or lowering the bottle. When the water level is the same both inside and outside the bottle (Figure 8.3.3), the pressure of the gas is equal to the atmospheric pressure, which can be measured with a barometer.

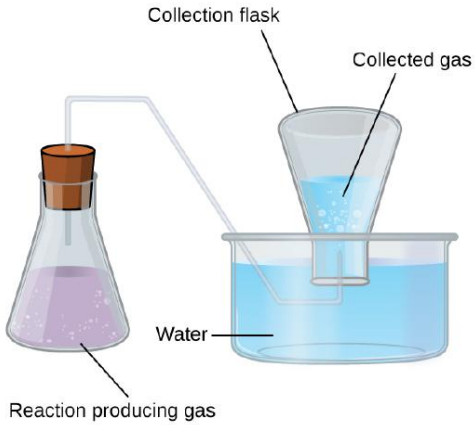

Figure 8.3.3: When a reaction produces a gas that is collected above water, the trapped gas is a mixture of the gas produced by the reaction and water vapor. If the collection flask is appropriately positioned to equalize the water levels both within and outside the flask, the pressure of the trapped gas mixture will equal the atmospheric pressure outside the flask (see the earlier discussion of manometers).

This figure shows a diagram of equipment used for collecting a gas over water. To the left is an Erlenmeyer flask. It is approximately two thirds full of a lavender colored liquid. Bubbles are evident in the liquid. The label “Reaction Producing Gas” appears below the flask. A line segment connects this label to the liquid in the flask. The flask has a stopper in it through which a single glass tube extends from the open region above the liquid in the flask up, through the stopper, to the right, then angles down into a pan that is nearly full of light blue water. This tube again extends right once it is well beneath the water’s surface. It then bends up into an inverted flask which is labeled “Collection Flask.” This collection flask is positioned with its mouth beneath the surface of the light blue water and appears approximately half full. Bubbles are evident in the water in the inverted flask. The open space above the water in the inverted flask is labeled “collected gas.”

However, there is another factor we must consider when we measure the pressure of the gas by this method. Water evaporates and there is always gaseous water (water vapor) above a sample of liquid water. As a gas is collected over water, it becomes saturated with water vapor and the total pressure of the mixture equals the partial pressure of the gas plus the partial pressure of the water vapor. The pressure of the pure gas is therefore equal to the total pressure minus the pressure of the water vapor—this is referred to as the “dry” gas pressure, that is, the pressure of the gas only, without water vapor.

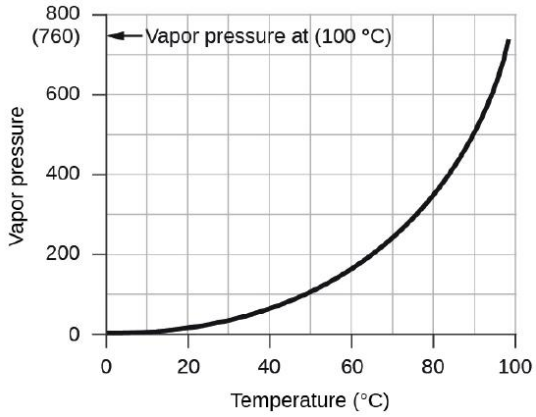

Figure 8.3.4: This graph shows the vapor pressure of water at sea level as a function of temperature.

A graph is shown. The horizontal axis is labeled “Temperature (degrees C)” with markings and labels provided for multiples of 20 beginning at 0 and ending at 100. The vertical axis is labeled “Vapor pressure (torr)” with marking and labels provided for multiples of 200, beginning at 0 and ending at 800. A smooth solid black curve extends from the origin up and to the right across the graph. The graph shows a positive trend with an increasing rate of change. On the vertical axis is (7 60) and an arrow pointing to it. The arrow is labeled, “Vapor pressure at (100 degrees C).”

The vapor pressure of water, which is the pressure exerted by water vapor in equilibrium with liquid water in a closed container, depends on the temperature (Figure 8.3.4); more detailed information on the temperature dependence of water vapor can be found in Table 8.3.1, and vapor pressure will be discussed in more detail in the next chapter on liquids.

Table 8.3.1: *Vapor Pressure of Ice and Water in Various Temperatures at Sea Level*

Temperature (°C)	Pressure (torr)	Temperature (°C)	Pressure (torr)	Temperature (°C)	Pressure (torr)
–10	1.95	18	15.5	30	31.8
–5	3.0	19	16.5	35	42.2
–2	3.9	20	17.5	40	55.3
0	4.6	21	18.7	50	92.5
2	5.3	22	19.8	60	149.4
4	6.1	23	21.1	70	233.7
6	7.0	24	22.4	80	355.1
8	8.0	25	23.8	90	525.8
10	9.2	26	25.2	95	633.9
12	10.5	27	26.7	99	733.2
14	12.0	28	28.3	100.0	760.0
16	13.6	29	30.0	101.0	787.6

Example 8.3.4: Pressure of a Gas Collected Over Water

If 0.200 L of argon is collected over water at a temperature of 26 °C and a pressure of 750 torr in a system like that shown in Figure 8.3.3, what is the partial pressure of argon?

Solution

According to Dalton’s law, the total pressure in the bottle (750 torr) is the sum of the partial pressure of argon and the partial pressure of gaseous water:

$$P_T = P_{Ar} + P_{H_2O}$$

Rearranging this equation to solve for the pressure of argon gives:

$$P_{Ar} = P_T - P_{H_2O}$$

The pressure of water vapor above a sample of liquid water at 26 °C is 25.2 torr (Appendix E), so:

$$P_{Ar} = 750 \text{ torr} - 25.2 \text{ torr} = 725 \text{ torr}$$

? Exercise 8.3.4

A sample of oxygen collected over water at a temperature of 29.0 °C and a pressure of 764 torr has a volume of 0.560 L. What volume would the dry oxygen have under the same conditions of temperature and pressure?

Answer

0.583 L

Chemical Stoichiometry and Gases

Chemical stoichiometry describes the quantitative relationships between reactants and products in chemical reactions. We have previously measured quantities of reactants and products using masses for solids and volumes in conjunction with the molarity for solutions; now we can also use gas volumes to indicate quantities. If we know the volume, pressure, and temperature of a gas, we can use the ideal gas equation to calculate how many moles of the gas are present. If we know how many moles of a gas are involved, we can calculate the volume of a gas at any temperature and pressure.

Avogadro's Law Revisited

Sometimes we can take advantage of a simplifying feature of the stoichiometry of gases that solids and solutions do not exhibit: All gases that show ideal behavior contain the same number of molecules in the same volume (at the same temperature and pressure). Thus, the ratios of volumes of gases involved in a chemical reaction are given by the coefficients in the equation for the reaction, provided that the gas volumes are measured at the same temperature and pressure.

We can extend Avogadro's law (that the volume of a gas is directly proportional to the number of moles of the gas) to chemical reactions with gases: Gases combine, or react, in definite and simple proportions by volume, provided that all gas volumes are measured at the same temperature and pressure. For example, since nitrogen and hydrogen gases react to produce ammonia gas according to

$$N_2(g) + 3\,H_2(g) \longrightarrow 2\,NH_3(g)$$

a given volume of nitrogen gas reacts with three times that volume of hydrogen gas to produce two times that volume of ammonia gas, if pressure and temperature remain constant.

The explanation for this is illustrated in Figure 8.3.4. According to Avogadro's law, equal volumes of gaseous N_2, H_2, and NH_3, at the same temperature and pressure, contain the same number of molecules. Because one molecule of N_2 reacts with three molecules of H_2 to produce two molecules of NH_3, the volume of H_2 required is three times the volume of N_2, and the volume of NH_3 produced is two times the volume of N_2.

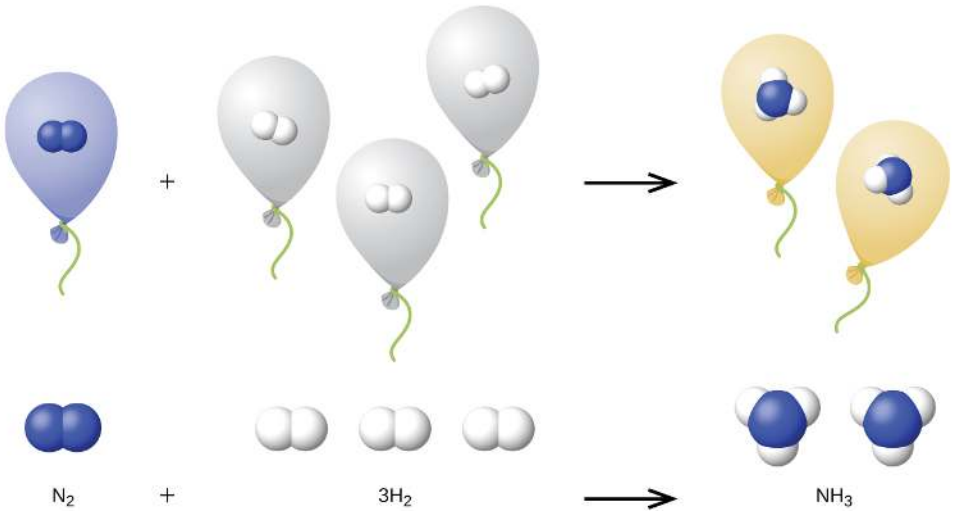

Figure **8.3.5**: *One volume of N_2 combines with three volumes of H_2 to form two volumes of NH_3.*

This diagram provided models the chemical reaction written with formulas across the bottom of the figure. The reaction is written; N subscript 2 plus 3 H subscript 2 followed by an arrow pointing right to N H subscript 3. Just above the formulas, space-filling models are provided. Above N H subscript 2, two blue spheres are bonded. Above 3 H subscript 2, three pairs of two slightly smaller white spheres are bonded. Above N H subscript 3, two molecules are shown composed each of a central blue sphere to which three slightly smaller white spheres are bonded. Across the top of the diagram, the reaction is illustrated with balloons. To the left is a light blue balloon which is labeled "N subscript 2". This balloon contains a single space-filling model composed of two bonded blue spheres. This balloon is followed by a plus sign, then three grey balloons which are each labeled "H subscript 2." Each of these balloons similarly contain a single space-filling model composed of two bonded white spheres. These white spheres are slightly smaller than the blue spheres. An arrow follows which points right to two light green balloons which are each labeled "N H subscript 3." Each light green balloon contains a space-filling model composed of a single central blue sphere to which three slightly smaller white spheres are bonded.

Example 8.3.5: Reaction of Gases

Propane, $C_3H_8(g)$, is used in gas grills to provide the heat for cooking. What volume of $O_2(g)$ measured at 25 °C and 760 torr is required to react with 2.7 L of propane measured under the same conditions of temperature and pressure? Assume that the propane undergoes complete combustion.

Solution

The ratio of the volumes of C_3H_8 and O_2 will be equal to the ratio of their coefficients in the balanced equation for the reaction:

$$\begin{array}{ll} \mathrm{C_3H_8}(g) + 5\,\mathrm{O_2}(g) \longrightarrow & 3\,\mathrm{CO_2}(g) + 4\,\mathrm{H_2O}(l) \quad (8.3.1) \\ 1\ \text{volume} + 5\ \text{volumes} & 3\ \text{volumes} + 4\ \text{volumes} \quad (8.3.2) \end{array}$$

From the equation, we see that one volume of C_3H_8 will react with five volumes of O_2:

$$2.7\ \cancel{\mathrm{L\ C_3H_8}} \times \frac{5\ \mathrm{L\ O_2}}{1\ \cancel{\mathrm{L\ C_3H_8}}} = 13.5\ \mathrm{L\ O_2}$$

A volume of 13.5 L of O_2 will be required to react with 2.7 L of C_3H_8.

Exercise 8.3.5

An acetylene tank for an oxyacetylene welding torch provides 9340 L of acetylene gas, C_2H_2, at 0 °C and 1 atm. How many tanks of oxygen, each providing 7.00×10^3 L of O_2 at 0 °C and 1 atm, will be required to burn the acetylene?

$$2\,\mathrm{C_2H_2} + 5\,\mathrm{O_2} \longrightarrow 4\,\mathrm{CO_2} + 2\,\mathrm{H_2O}$$

Answer

3.34 tanks (2.34×10^4 L)

Example 8.3.6: Volumes of Reacting Gases

Ammonia is an important fertilizer and industrial chemical. Suppose that a volume of 683 billion cubic feet of gaseous ammonia, measured at 25 °C and 1 atm, was manufactured. What volume of $H_2(g)$, measured under the same conditions, was required to prepare this amount of ammonia by reaction with N_2?

$$N_2(g) + 3\,H_2(g) \longrightarrow 2\,NH_3(g)$$

Solution

Because equal volumes of H_2 and NH_3 contain equal numbers of molecules and each three molecules of H_2 that react produce two molecules of NH_3, the ratio of the volumes of H_2 and NH_3 will be equal to 3:2. Two volumes of NH_3, in this case in units of billion ft^3, will be formed from three volumes of H_2:

$$683 \text{ billion ft}^3 \text{ NH}_3 \times \frac{3 \text{ billion ft}^3 \text{ H}_2}{2 \text{ billion ft}^3 \text{ NH}_3} = 1.02 \times 10^3 \text{ billion ft}^3 \text{ H}_2$$

The manufacture of 683 billion ft^3 of NH_3 required 1020 billion ft^3 of H_2. (At 25 °C and 1 atm, this is the volume of a cube with an edge length of approximately 1.9 miles.)

Exercise 8.3.6

What volume of $O_2(g)$ measured at 25 °C and 760 torr is required to react with 17.0 L of ethylene, $C_2H_4(g)$, measured under the same conditions of temperature and pressure? The products are CO_2 and water vapor.

Answer

51.0 L

Example 8.3.7: Volume of Gaseous Product

What volume of hydrogen at 27 °C and 723 torr may be prepared by the reaction of 8.88 g of gallium with an excess of hydrochloric acid?

$$2\,Ga(s) + 6\,HCl(aq) \longrightarrow 2\,GaCl_3(aq) + 3\,H_2(g)$$

Solution

To convert from the mass of gallium to the volume of $H_2(g)$, we need to do something like this:

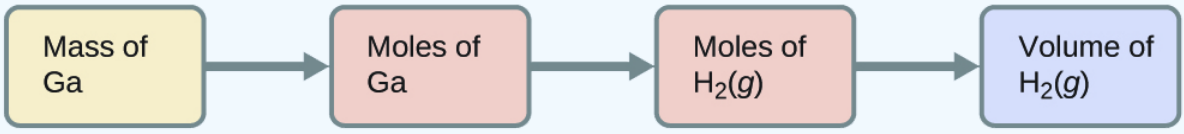

The first two conversions are:

$$8.88 \text{ g Ga} \times \frac{1 \text{ mol Ga}}{69.723 \text{ g Ga}} \times \frac{3 \text{ mol H}_2}{2 \text{ mol Ga}} = 0.191 \text{ mol H}_2$$

Finally, we can use the ideal gas law:

$$V_{H_2} = \left(\frac{nRT}{P}\right)_{H_2} = \frac{0.191 \text{ mol} \times 0.08206 \text{ L atm mol}^{-1} \text{ K}^{-1} \times 300 \text{ K}}{0.951 \text{ atm}} = 4.94 \text{ L}$$

Exercise 8.3.7

Sulfur dioxide is an intermediate in the preparation of sulfuric acid. What volume of SO_2 at 343 °C and 1.21 atm is produced by burning l.00 kg of sulfur in oxygen?

Answer

1.30×10^3 L

Greenhouse Gases and Climate Change

The thin skin of our atmosphere keeps the earth from being an ice planet and makes it habitable. In fact, this is due to less than 0.5% of the air molecules. Of the energy from the sun that reaches the earth, almost $\frac{1}{3}$ is reflected back into space, with the rest absorbed by the atmosphere and the surface of the earth. Some of the energy that the earth absorbs is re-emitted as infrared (IR) radiation, a portion of which passes back out through the atmosphere into space. However, most of this IR radiation is absorbed by certain substances in the atmosphere, known as greenhouse gases, which re-emit this energy in all directions, trapping some of the heat. This maintains favorable living conditions—without atmosphere, the average global average temperature of 14 °C (57 °F) would be about –19 °C (–2 °F). The major greenhouse gases (GHGs) are water vapor, carbon dioxide, methane, and ozone. Since the Industrial Revolution, human activity has been increasing the concentrations of GHGs, which have changed the energy balance and are significantly altering the earth's climate (Figure 8.3.6).

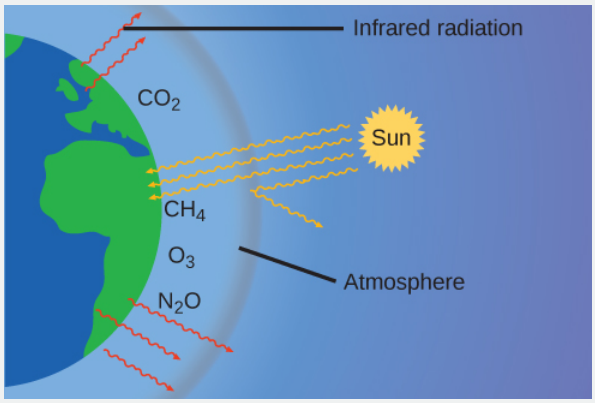

Figure 8.3.6: Greenhouse gases trap enough of the sun's energy to make the planet habitable—this is known as the greenhouse effect. Human activities are increasing greenhouse gas levels, warming the planet and causing more extreme weather events.

There is strong evidence from multiple sources that higher atmospheric levels of CO_2 are caused by human activity, with fossil fuel burning accounting for about $\frac{3}{4}$ of the recent increase in CO_2. Reliable data from ice cores reveals that CO_2 concentration in the atmosphere is at the highest level in the past 800,000 years; other evidence indicates that it may be at its highest level in 20 million years. In recent years, the CO_2 concentration has increased from historical levels of below 300 ppm to almost 400 ppm today (Figure 8.3.7).

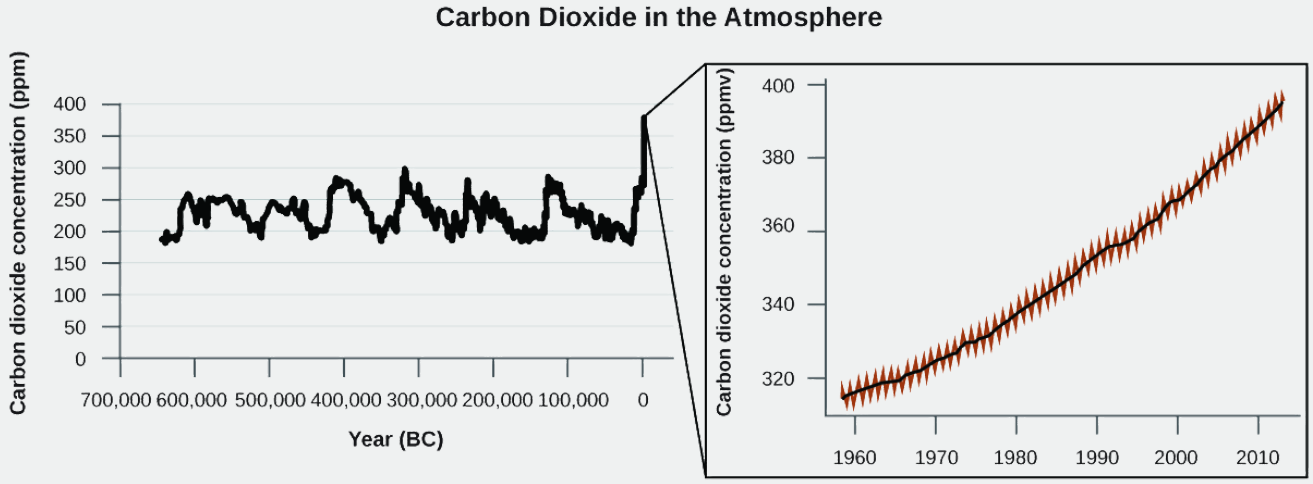

Figure **8.3.7**: Figure CO_2 levels over the past 700,000 years were typically from 200–300 ppm, with a steep, unprecedented increase over the past 50 years.

Summary

The ideal gas law can be used to derive a number of convenient equations relating directly measured quantities to properties of interest for gaseous substances and mixtures. Appropriate rearrangement of the ideal gas equation may be made to permit the calculation of gas densities and molar masses. Dalton's law of partial pressures may be used to relate measured gas pressures for gaseous mixtures to their compositions. Avogadro's law may be used in stoichiometric computations for chemical reactions involving gaseous reactants or products.

Key Equations

- $P_{Total} = P_A + P_B + P_C + \ldots = \Sigma_i P_i$
- $P_A = X_A P_{Total}$
- $X_A = \frac{n_A}{n_{Total}}$

Footnotes

1. "Quotations by Joseph-Louis Lagrange," last modified February 2006, accessed February 10, 2015, www-history.mcs.st-andrews.ac.../Lagrange.html

Summary

Dalton's law of partial pressures

total pressure of a mixture of ideal gases is equal to the sum of the partial pressures of the component gases.

mole fraction (*X*)

concentration unit defined as the ratio of the molar amount of a mixture component to the total number of moles of all mixture components

partial pressure

pressure exerted by an individual gas in a mixture

vapor pressure of water

pressure exerted by water vapor in equilibrium with liquid water in a closed container at a specific temperature

This page titled 8.3: Stoichiometry of Gaseous Substances, Mixtures, and Reactions is shared under a CC BY license and was authored, remixed, and/or curated by OpenStax.

- **9.3: Stoichiometry of Gaseous Substances, Mixtures, and Reactions** by OpenStax is licensed CC BY 4.0. Original source: https://openstax.org/details/books/chemistry-2e.

https://chem.libretexts.org/@go/page/162484

https://chem.libretexts.org/@go/page/162484

https://chem.libretexts.org/@go/page/162484

https://chem.libretexts.org/@go/page/162484

8.4: Effusion and Diffusion of Gases

Learning Objectives

- Define and explain effusion and diffusion
- State Graham's law and use it to compute relevant gas properties

If you have ever been in a room when a piping hot pizza was delivered, you have been made aware of the fact that gaseous molecules can quickly spread throughout a room, as evidenced by the pleasant aroma that soon reaches your nose. Although gaseous molecules travel at tremendous speeds (hundreds of meters per second), they collide with other gaseous molecules and travel in many different directions before reaching the desired target. At room temperature, a gaseous molecule will experience billions of collisions per second. The mean free path is the average distance a molecule travels between collisions. The mean free path increases with decreasing pressure; in general, the mean free path for a gaseous molecule will be hundreds of times the diameter of the molecule

In general, we know that when a sample of gas is introduced to one part of a closed container, its molecules very quickly disperse throughout the container; this process by which molecules disperse in space in response to differences in concentration is called diffusion (shown in Figure 8.4.1). The gaseous atoms or molecules are, of course, unaware of any concentration gradient, they simply move randomly—regions of higher concentration have more particles than regions of lower concentrations, and so a net movement of species from high to low concentration areas takes place. In a closed environment, diffusion will ultimately result in equal concentrations of gas throughout, as depicted in Figure 8.4.1. The gaseous atoms and molecules continue to move, but since their concentrations are the same in both bulbs, the rates of transfer between the bulbs are equal (no *net* transfer of molecules occurs).

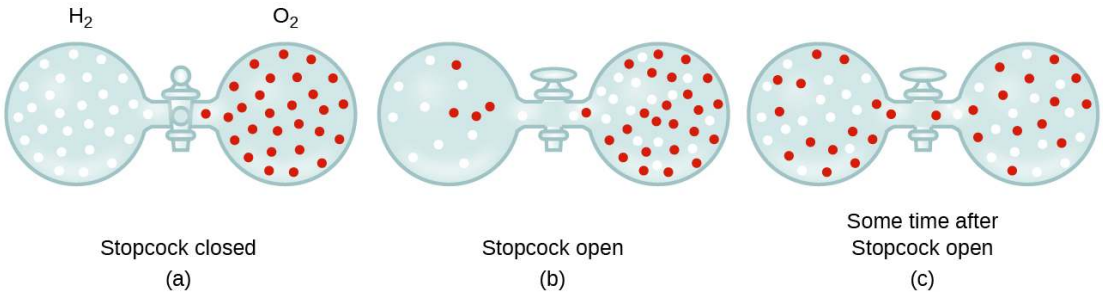

Figure 8.4.1: (a) Two gases, H_2 and O_2, are initially separated. (b) When the stopcock is opened, they mix together. The lighter gas, H_2, passes through the opening faster than O_2, so just after the stopcock is opened, more H_2 molecules move to the O_2 side than O_2 molecules move to the H_2 side. (c) After a short time, both the slower-moving O_2 molecules and the faster-moving H_2 molecules have distributed themselves evenly on both sides of the vessel.

In this figure, three pairs of gas filled spheres or vessels are shown connected with a stopcock between them. In a, the figure is labeled, "Stopcock closed." Above, the left sphere is labeled, "H subscript 2." It contains approximately 30 small, white, evenly distributed circles. The sphere to its right is labeled, "O subscript 2." It contains approximately 30 small red evenly distributed circles. In b, the figure is labeled, "Stopcock open." The stopcock valve handle is now parallel to the tube connecting the two spheres. On the left, approximately 9 small, white circles and 4 small, red circles are present, with the red spheres appearing slightly closer to the stopcock. On the right side, approximately 25 small, red spheres and 21 small, white spheres are present, with the concentration of white spheres slightly greater near the stopcock. In c, the figure is labeled "Some time after Stopcock open." In this situation, the red and white spheres appear evenly mixed and uniformly distributed throughout both spheres.

We are often interested in the rate of diffusion, the amount of gas passing through some area per unit time:

$$\text{rate of diffusion} = \frac{\text{amount of gas passing through an area}}{\text{unit of time}}$$

The diffusion rate depends on several factors: the concentration gradient (the increase or decrease in concentration from one point to another); the amount of surface area available for diffusion; and the distance the gas particles must travel. Note also that the time required for diffusion to occur is inversely proportional to the rate of diffusion, as shown in the rate of diffusion equation.

A process involving movement of gaseous species similar to diffusion is effusion, the escape of gas molecules through a tiny hole such as a pinhole in a balloon into a vacuum (Figure 8.4.1). Although diffusion and effusion rates both depend on the molar mass of

the gas involved, their rates are not equal; however, the ratios of their rates are the same.

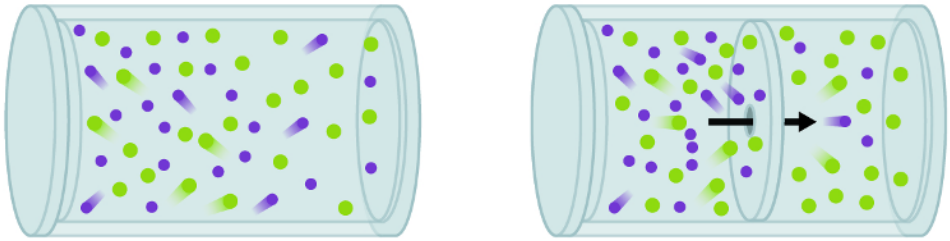

Figure 8.4.2: Diffusion occurs when gas molecules disperse throughout a container. Effusion occurs when a gas passes through an opening that is smaller than the mean free path of the particles, that is, the average distance traveled between collisions. Effectively, this means that only one particle passes through at a time.

This figure contains two cylindrical containers which are oriented horizontally. The first is labeled “Diffusion.” In this container, approximately 25 purple and 25 green circles are shown, evenly distributed throughout the container. “Trails” behind some of the circles indicate motion. In the second container, which is labeled “Effusion,” a boundary layer is evident across the center of the cylindrical container, dividing the cylinder into two halves. A black arrow is drawn pointing through this boundary from left to right. To the left of the boundary, approximately 16 green circles and 20 purple circles are shown again with motion indicated by “trails” behind some of the circles. To the right of the boundary, only 4 purple and 16 green circles are shown.

If a mixture of gases is placed in a container with porous walls, the gases effuse through the small openings in the walls. The lighter gases pass through the small openings more rapidly (at a higher rate) than the heavier ones (Figure 8.4.2). In 1832, Thomas Graham studied the rates of effusion of different gases and formulated Graham’s law of effusion: *The rate of effusion of a gas is inversely proportional to the square root of the mass of its particles*:

$$\text{rate of effusion} \propto \frac{1}{\sqrt{\mathcal{M}}}$$

This means that if two gases A and B are at the same temperature and pressure, the ratio of their effusion rates is inversely proportional to the ratio of the square roots of the masses of their particles:

$$\frac{\text{rate of effusion of B}}{\text{rate of effusion of A}} = \frac{\sqrt{\mathcal{M}_\text{A}}}{\sqrt{\mathcal{M}_\text{B}}}$$



Figure 8.4.3: A balloon filled with air (the blue one) remains full overnight. A balloon filled with helium (the green one) partially deflates because the smaller, light helium atoms effuse through small holes in the rubber much more readily than the heavier molecules of nitrogen and oxygen found in air. (credit: modification of work by Mark Ott)

This figure shows two photos. The first photo shows a blue balloon which floats above a green balloon. The green balloon is resting on a surface. Both balloons are about the same size. The second photo shows the same two balloons, but the blue one is now smaller than the green one. Both are resting on a surface.

Example 8.4.1: Applying Graham’s Law to Rates of Effusion

Calculate the ratio of the rate of effusion of hydrogen to the rate of effusion of oxygen.

Solution

From Graham’s law, we have:

$$\frac{\text{rate of effusion of hydrogen}}{\text{rate of effusion of oxygen}} = \frac{\sqrt{1.43\ \text{g L}^{-1}}}{\sqrt{0.0899\ \text{g L}^{-1}}} = \frac{1.20}{0.300} = \frac{4}{1}$$

Using molar masses:

$$\frac{\text{rate of effusion of hydrogen}}{\text{rate of effusion of oxygen}} = \frac{32\ \text{g mol}^{-1}}{2\ \text{g mol}^{-1}} = \frac{\sqrt{16}}{\sqrt{1}} = \frac{4}{1}$$

Hydrogen effuses four times as rapidly as oxygen.

? Exercise 8.4.1

At a particular pressure and temperature, nitrogen gas effuses at the rate of 79 mL/s. Using the same apparatus at the same temperature and pressure, at what rate will sulfur dioxide effuse?

Answer

52 mL/s

Here's another example, making the point about how determining times differs from determining rates.

✔ Example 8.4.2: Effusion Time Calculations

It takes 243 s for 4.46×10^{-5} mol Xe to effuse through a tiny hole. Under the same conditions, how long will it take 4.46×10^{-5} mol Ne to effuse?

Solution

It is important to resist the temptation to use the times directly, and to remember how rate relates to time as well as how it relates to mass. Recall the definition of rate of effusion:

$$\text{rate of effusion} = \frac{\text{amount of gas transferred}}{\text{time}}$$

and combine it with Graham's law:

$$\frac{\text{rate of effusion of gas Xe}}{\text{rate of effusion of gas Ne}} = \frac{\sqrt{\mathcal{M}_{\text{Ne}}}}{\sqrt{\mathcal{M}_{\text{Xe}}}}$$

To get:

$$\frac{\dfrac{\text{amount of Xe transferred}}{\text{time for Xe}}}{\dfrac{\text{amount of Ne transferred}}{\text{time for Ne}}} = \frac{\sqrt{\mathcal{M}_{\text{Ne}}}}{\sqrt{\mathcal{M}_{\text{Xe}}}}$$

Noting that *amount of A* = *amount of B*, and solving for *time for Ne*:

$$\frac{\dfrac{\cancel{\text{amount of Xe}}}{\text{time for Xe}}}{\dfrac{\cancel{\text{amount of Ne}}}{\text{time for Ne}}} = \frac{\text{time for Ne}}{\text{time for Xe}} = \frac{\sqrt{\mathcal{M}_{\text{Ne}}}}{\sqrt{\mathcal{M}_{\text{Xe}}}} = \frac{\sqrt{\mathcal{M}_{\text{Ne}}}}{\sqrt{\mathcal{M}_{\text{Xe}}}}$$

and substitute values:

$$\frac{\text{time for Ne}}{243\ \text{s}} = \sqrt{\frac{20.2\ \text{g mol}}{131.3\ \text{g mol}}} = 0.392$$

Finally, solve for the desired quantity:

$$\text{time for Ne} = 0.392 \times 243 \text{ s} = 95.3 \text{ s}$$

Note that this answer is reasonable: Since Ne is lighter than Xe, the effusion rate for Ne will be larger than that for Xe, which means the time of effusion for Ne will be smaller than that for Xe.

? Exercise 8.4.2

A party balloon filled with helium deflates to $\frac{2}{3}$ of its original volume in 8.0 hours. How long will it take an identical balloon filled with the same number of moles of air ($\mathcal{M}$ = 28.2 g/mol) to deflate to $\frac{1}{2}$ of its original volume?

Answer

32 h

Finally, here is one more example showing how to calculate molar mass from effusion rate data.

✓ Example 8.4.3: Determining Molar Mass Using Graham's Law

An unknown gas effuses 1.66 times more rapidly than CO_2. What is the molar mass of the unknown gas? Can you make a reasonable guess as to its identity?

Solution

From Graham's law, we have:

$$\frac{\text{rate of effusion of Unknown}}{\text{rate of effusion of CO}_2} = \frac{\sqrt{\mathcal{M}_{CO_2}}}{\sqrt{\mathcal{M}_{Unknown}}}$$

Plug in known data:

$$\frac{1.66}{1} = \frac{\sqrt{44.0 \text{ g/mol}}}{\sqrt{\mathcal{M}_{Unknown}}}$$

Solve:

$$\mathcal{M}_{Unknown} = \frac{44.0 \text{ g/mol}}{(1.66)^2} = 16.0 \text{ g/mol}$$

The gas could well be CH_4, the only gas with this molar mass.

? Exercise

Hydrogen gas effuses through a porous container 8.97-times faster than an unknown gas. Estimate the molar mass of the unknown gas.

Answer

163 g/mol

Application: Use of Diffusion for Uranium Enrichment

Gaseous diffusion has been used to produce enriched uranium for use in nuclear power plants and weapons. Naturally occurring uranium contains only 0.72% of ^{235}U, the kind of uranium that is "fissile," that is, capable of sustaining a nuclear fission chain reaction. Nuclear reactors require fuel that is 2–5% ^{235}U, and nuclear bombs need even higher concentrations. One way to enrich uranium to the desired levels is to take advantage of Graham's law. In a gaseous diffusion enrichment plant, uranium hexafluoride (UF_6, the only uranium compound that is volatile enough to work) is slowly pumped through large cylindrical vessels called diffusers, which contain porous barriers with microscopic openings. The process is one of diffusion because the other side of the barrier is not evacuated. The $^{235}UF_6$ molecules have a higher average speed and diffuse through

the barrier a little faster than the heavier $^{238}UF_6$ molecules. The gas that has passed through the barrier is slightly enriched in $^{235}UF_6$ and the residual gas is slightly depleted. The small difference in molecular weights between $^{235}UF_6$ and $^{238}UF_6$ only about 0.4% enrichment, is achieved in one diffuser (Figure **8.4.4**). But by connecting many diffusers in a sequence of stages (called a cascade), the desired level of enrichment can be attained.

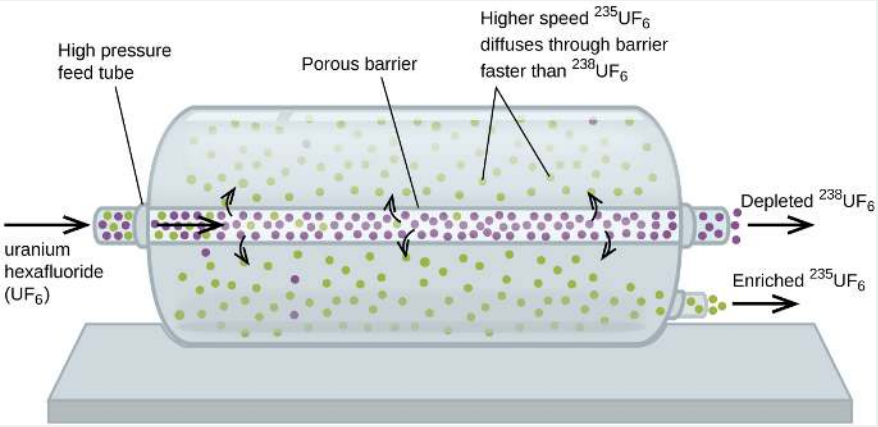

Figure **8.4.4**: In a diffuser, gaseous UF_6 is pumped through a porous barrier, which partially separates $^{235}UF_6$ from $^{238}UF_6$ The UF_6 must pass through many large diffuser units to achieve sufficient enrichment in ^{235}U.

This figure shows a large cylindrical container oriented horizontally. A narrow tube or pipe which is labeled “porous barrier” runs horizontally through the center of the tube and extends a short distance out from the left and right ends of the cylinder. At the far left, an arrow points right into the tube. This arrow is labele, “Uranium hexafluoride (U F subscript 6).” A line segment connects the label, “High pressure feed tube,” to the tube where it enters the cylinder. In the short region of tube outside the cylinder, 5 small, purple circles and 4 small, green circles are present. Inside the cylinder, an arrow points right through the tube which contains many evenly distributed, purple circles and a handful of green circles which decrease in quantity moving left to right through the cylinder. Curved arrows extend from the inner area of the tube into the outer region of the cylinder. Three of these arrows point into the area above the tube and three point into the area below. Two line segments extend from the label, “Higher speed superscript 235 U F subscript 6 diffuses through barrier faster than superscript 238 U F subscript 6,” to two green circles in the space above the tube. In the short section of tubing just outside the cylinder, 8 small, purple circles are present. An arrow labeled, “Depleted superscript 238 U F subscript 6,” points right extending from the end of this tube. The larger space outside the tube contains approximately 100 evenly distributed small green circles and only 5 purple circles. Eight of the purple circles appear at the left end of the cylinder. A tube exits the lower right end of the cylinder. It has 5 green circles followed by a right pointing arrow and the label, “Enriched superscript 235 U F subscript 6.”

The large scale separation of gaseous $^{235}UF_6$ from $^{238}UF_6$ was first done during the World War II, at the atomic energy installation in Oak Ridge, Tennessee, as part of the Manhattan Project (the development of the first atomic bomb). Although the theory is simple, this required surmounting many daunting technical challenges to make it work in practice. The barrier must have tiny, uniform holes (about 10^{-6} cm in diameter) and be porous enough to produce high flow rates. All materials (the barrier, tubing, surface coatings, lubricants, and gaskets) need to be able to contain, but not react with, the highly reactive and corrosive UF_6.

Because gaseous diffusion plants require very large amounts of energy (to compress the gas to the high pressures required and drive it through the diffuser cascade, to remove the heat produced during compression, and so on), it is now being replaced by gas centrifuge technology, which requires far less energy. A current hot political issue is how to deny this technology to Iran, to prevent it from producing enough enriched uranium for them to use to make nuclear weapons.

Summary

Gaseous atoms and molecules move freely and randomly through space. Diffusion is the process whereby gaseous atoms and molecules are transferred from regions of relatively high concentration to regions of relatively low concentration. Effusion is a similar process in which gaseous species pass from a container to a vacuum through very small orifices. The rates of effusion of gases are inversely proportional to the square roots of their densities or to the square roots of their atoms/molecules’ masses (Graham’s law).

Key Equations

- $\text{rate of diffusion} = \dfrac{\text{amount of gas passing through an area}}{\text{unit of time}}$
- $\dfrac{\text{rate of effusion of gas A}}{\text{rate of effusion of gas B}} = \dfrac{\sqrt{m_B}}{\sqrt{m_A}} = \dfrac{\sqrt{\mathcal{M}_B}}{\sqrt{\mathcal{M}_A}}$

Summary

diffusion

movement of an atom or molecule from a region of relatively high concentration to one of relatively low concentration (discussed in this chapter with regard to gaseous species, but applicable to species in any phase)

effusion

transfer of gaseous atoms or molecules from a container to a vacuum through very small openings

Graham's law of effusion

rates of diffusion and effusion of gases are inversely proportional to the square roots of their molecular masses

mean free path

average distance a molecule travels between collisions

rate of diffusion

amount of gas diffusing through a given area over a given time

---

This page titled 8.4: Effusion and Diffusion of Gases is shared under a CC BY license and was authored, remixed, and/or curated by OpenStax.

- **9.4: Effusion and Diffusion of Gases** by OpenStax is licensed CC BY 4.0. Original source: https://openstax.org/details/books/chemistry-2e.

https://chem.libretexts.org/@go/page/162485

https://chem.libretexts.org/@go/page/162485

8.5: The Kinetic-Molecular Theory

Skills to Develop

- State the postulates of the kinetic-molecular theory
- Use this theory's postulates to explain the gas laws

The gas laws that we have seen to this point, as well as the ideal gas equation, are empirical, that is, they have been derived from experimental observations. The mathematical forms of these laws closely describe the macroscopic behavior of most gases at pressures less than about 1 or 2 atm. Although the gas laws describe relationships that have been verified by many experiments, they do not tell us why gases follow these relationships.

The kinetic molecular theory (KMT) is a simple microscopic model that effectively explains the gas laws described in previous modules of this chapter. This theory is based on the following five postulates described here. (Note: The term "molecule" will be used to refer to the individual chemical species that compose the gas, although some gases are composed of atomic species, for example, the noble gases.)

1. Gases are composed of molecules that are in continuous motion, travelling in straight lines and changing direction only when they collide with other molecules or with the walls of a container.
2. The molecules composing the gas are negligibly small compared to the distances between them.
3. The pressure exerted by a gas in a container results from collisions between the gas molecules and the container walls.
4. Gas molecules exert no attractive or repulsive forces on each other or the container walls; therefore, their collisions are *elastic* (do not involve a loss of energy).
5. The average kinetic energy of the gas molecules is proportional to the kelvin temperature of the gas.

The test of the KMT and its postulates is its ability to explain and describe the behavior of a gas. The various gas laws can be derived from the assumptions of the KMT, which have led chemists to believe that the assumptions of the theory accurately represent the properties of gas molecules. We will first look at the individual gas laws (Boyle's, Charles's, Amontons's, Avogadro's, and Dalton's laws) conceptually to see how the KMT explains them. Then, we will more carefully consider the relationships between molecular masses, speeds, and kinetic energies with temperature, and explain Graham's law.

The Kinetic-Molecular Theory Explains the Behavior of Gases, Part I

Recalling that gas pressure is exerted by rapidly moving gas molecules and depends directly on the number of molecules hitting a unit area of the wall per unit of time, we see that the KMT conceptually explains the behavior of a gas as follows:

- *Amontons's law.* If the temperature is increased, the average speed and kinetic energy of the gas molecules increase. If the volume is held constant, the increased speed of the gas molecules results in more frequent and more forceful collisions with the walls of the container, therefore increasing the pressure (Figure **8.5.1*a***).
- *Charles's law.* If the temperature of a gas is increased, a constant pressure may be maintained only if the volume occupied by the gas increases. This will result in greater average distances traveled by the molecules to reach the container walls, as well as increased wall surface area. These conditions will decrease both the frequency of molecule-wall collisions and the number of collisions per unit area, the combined effects of which balance the effect of increased collision forces due to the greater kinetic energy at the higher temperature.
- *Boyle's law.* If the gas volume is decreased, the container wall area decreases and the molecule-wall collision frequency increases, both of which increase the pressure exerted by the gas (Figure **8.5.1*b***).
- *Avogadro's law.* At constant pressure and temperature, the frequency and force of molecule-wall collisions are constant. Under such conditions, increasing the number of gaseous molecules will require a proportional increase in the container volume in order to yield a decrease in the number of collisions per unit area to compensate for the increased frequency of collisions (Figure **8.5.1*c***).
- *Dalton's Law.* Because of the large distances between them, the molecules of one gas in a mixture bombard the container walls with the same frequency whether other gases are present or not, and the total pressure of a gas mixture equals the sum of the (partial) pressures of the individual gases.

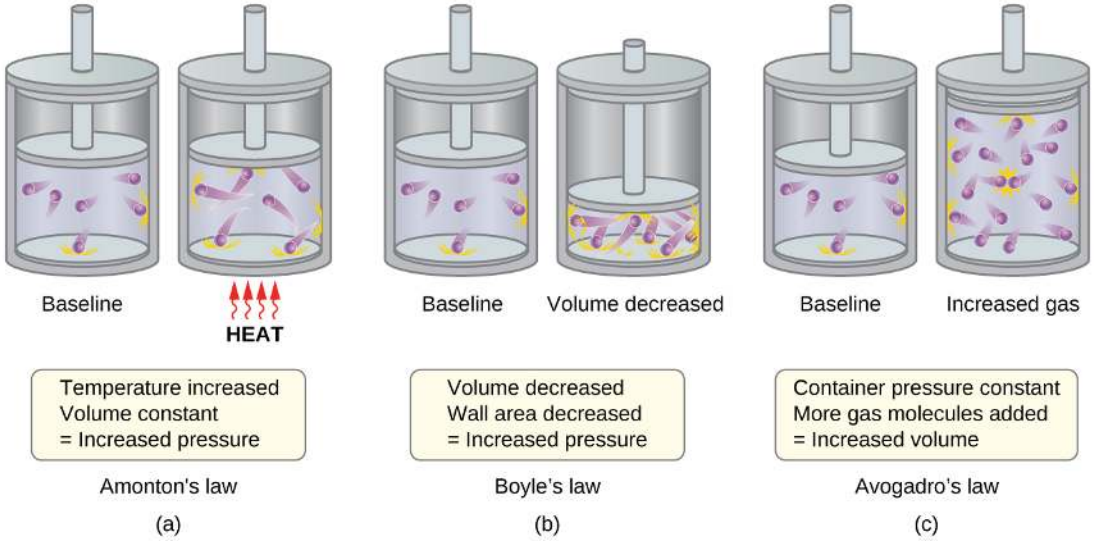

Figure 8.5.1: (a) When gas temperature increases, gas pressure increases due to increased force and frequency of molecular collisions. (b) When volume decreases, gas pressure increases due to increased frequency of molecular collisions. (c) When the amount of gas increases at a constant pressure, volume increases to yield a constant number of collisions per unit wall area per unit time.

> *The gas simulator may be used to examine the effect of temperature on molecular velocities. Examine the simulator's "energy histograms" (molecular speed distributions) and "species information" (which gives average speed values) for molecules of different masses at various temperatures*

Summary

The kinetic molecular theory is a simple but very effective model that effectively explains ideal gas behavior. The theory assumes that gases consist of widely separated molecules of negligible volume that are in constant motion, colliding elastically with one another and the walls of their container with average velocities determined by their absolute temperatures. The individual molecules of a gas exhibit a range of velocities, the distribution of these velocities being dependent on the temperature of the gas and the mass of its molecules.

Glossary

kinetic molecular theory
theory based on simple principles and assumptions that effectively explains ideal gas behavior

Contributors

- Paul Flowers (University of North Carolina - Pembroke), Klaus Theopold (University of Delaware) and Richard Langley (Stephen F. Austin State University) with contributing authors. Textbook content produced by OpenStax College is licensed under a Creative Commons Attribution License 4.0 license. Download for free at http://cnx.org/contents/85abf193-2bd...a7ac8df6@9.110).

This page titled 8.5: The Kinetic-Molecular Theory is shared under a CC BY license and was authored, remixed, and/or curated by OpenStax.

CHAPTER OVERVIEW

9: Liquids and Solids

A general chemistry Libretexts Textmap organized around the textbook
General Chemistry -Atoms First
By OpenStax

I *II* *III* *IV* *V* *VI* *VII* *VIII* *IX* *X* *XI* *XII* *XIII* *XIV* *XV* *XVI* *XVII* *XVIII* *XIX* *XX* *XXI* ● **Homework**

The great distances between atoms and molecules in a gaseous phase, and the corresponding absence of any significant interactions between them, allows for simple descriptions of many physical properties that are the same for all gases, regardless of their chemical identities. As described in the final module of the chapter on gases, this situation changes at high pressures and low temperatures—conditions that permit the atoms and molecules to interact to a much greater extent. In the liquid and solid states, these interactions are of considerable strength and play an important role in determining a number of physical properties that *do* depend on the chemical identity of the substance. In this chapter, the nature of these interactions and their effects on various physical properties of liquid and solid phases will be examined.

9.1: Prelude to Liquids and Solids
9.2: Intermolecular Forces
9.3: Properties of Liquids
9.4: Phase Transitions
9.5: The Solid State of Matter

Contributors

- Paul Flowers (University of North Carolina - Pembroke), Klaus Theopold (University of Delaware) and Richard Langley (Stephen F. Austin State University) with contributing authors. Textbook content produced by OpenStax College is licensed under a Creative Commons Attribution License 4.0 license. Download for free at http://cnx.org/contents/85abf193-2bd...a7ac8df6@9.110).

This page titled 9: Liquids and Solids is shared under a CC BY license and was authored, remixed, and/or curated by OpenStax.

9.1: Prelude to Liquids and Solids

The great distances between atoms and molecules in a gaseous phase, and the corresponding absence of any significant interactions between them, allows for simple descriptions of many physical properties that are the same for all gases, regardless of their chemical identities. As described in the final module of the chapter on gases, this situation changes at high pressures and low temperatures—conditions that permit the atoms and molecules to interact to a much greater extent.

Figure **9.1.1**: Solid carbon dioxide (“dry ice”, left) sublimes vigorously when placed in a liquid (right), cooling the liquid and generating a fog of condensed water vapor above the cylinder. (credit: modification of work by Paul Flowers)

This figure shows pieces of a white substance which appear to be sublimating. To the right of these pieces are three graduated cylinders. Each cylinder holds a different color liquid, and above the liquid, the cylinders are filled with a fog-like substance. This fog-like substance swirls out of the top and around the outside of the cylinders.

In the liquid and solid states, these interactions are of considerable strength and play an important role in determining a number of physical properties that *do* depend on the chemical identity of the substance. In this chapter, the nature of these interactions and their effects on various physical properties of liquid and solid phases will be examined.

This page titled 9.1: Prelude to Liquids and Solids is shared under a CC BY license and was authored, remixed, and/or curated by OpenStax.

- **10.1: Prelude to Liquids and Solids** by OpenStax is licensed CC BY 4.0. Original source: https://openstax.org/details/books/chemistry-2e.

9.2: Intermolecular Forces

Learning Objectives

- Describe the types of intermolecular forces possible between atoms or molecules in condensed phases (dispersion forces, dipole-dipole attractions, and hydrogen bonding)
- Identify the types of intermolecular forces experienced by specific molecules based on their structures
- Explain the relation between the intermolecular forces present within a substance and the temperatures associated with changes in its physical state

As was the case for gaseous substances, the kinetic molecular theory may be used to explain the behavior of solids and liquids. In the following description, the term *particle* will be used to refer to an atom, molecule, or ion. Note that we will use the popular phrase "intermolecular attraction" to refer to attractive forces between the particles of a substance, regardless of whether these particles are molecules, atoms, or ions.

Consider these two aspects of the molecular-level environments in solid, liquid, and gaseous matter:

- Particles in a solid are tightly packed together and often arranged in a regular pattern; in a liquid, they are close together with no regular arrangement; in a gas, they are far apart with no regular arrangement.
- Particles in a solid vibrate about fixed positions and do not generally move in relation to one another; in a liquid, they move past each other but remain in essentially constant contact; in a gas, they move independently of one another except when they collide.

The differences in the properties of a solid, liquid, or gas reflect the strengths of the attractive forces between the atoms, molecules, or ions that make up each phase. The phase in which a substance exists depends on the relative extents of its intermolecular forces (IMFs) and the kinetic energies (KE) of its molecules. IMFs are the various forces of attraction that may exist between the atoms and molecules of a substance due to electrostatic phenomena, as will be detailed in this module. These forces serve to hold particles close together, whereas the particles' KE provides the energy required to overcome the attractive forces and thus increase the distance between particles. Figure 9.2.1 illustrates how changes in physical state may be induced by changing the temperature, hence, the average KE, of a given substance.

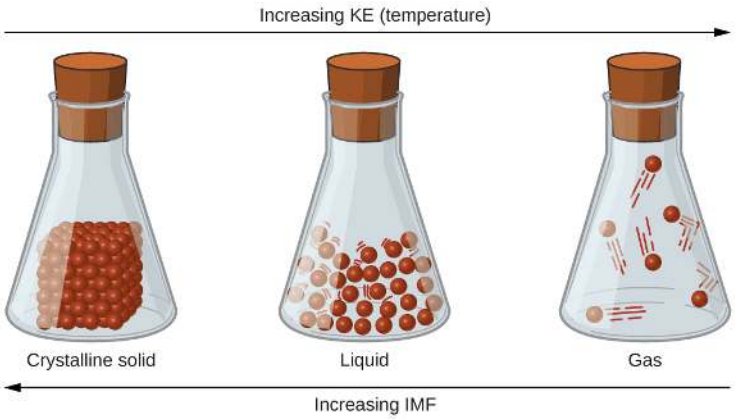

Figure 9.2.1: Transitions between solid, liquid, and gaseous states of a substance occur when conditions of temperature or pressure favor the associated changes in intermolecular forces. (Note: The space between particles in the gas phase is much greater than shown.)

Three sealed flasks are labeled, "Crystalline solid," "Liquid," and "Gas," from left to right. The first flask holds a cube composed of small spheres sitting on the bottom while the second flask shows a lot of small spheres in the bottom that are spaced a small distance apart from one another and have lines around them to indicate motion. The third flask shows a few spheres spread far from one another with larger lines to indicate motion. There is a right-facing arrow that spans the top of all three flasks. The arrow is labeled, "Increasing K E (temperature)." There is a left-facing arrow that spans the bottom of all three flasks. The arrow is labeled, "Increasing I M F."

As an example of the processes depicted in this figure, consider a sample of water. When gaseous water is cooled sufficiently, the attractions between H_2O molecules will be capable of holding them together when they come into contact with each other; the gas

condenses, forming liquid H_2O. For example, liquid water forms on the outside of a cold glass as the water vapor in the air is cooled by the cold glass, as seen in Figure **9.2.2**.

Figure **9.2.2**: Condensation forms when water vapor in the air is cooled enough to form liquid water, such as (a) on the outside of a cold beverage glass or (b) in the form of fog. (credit a: modification of work by Jenny Downing; credit b: modification of work by Cory Zanker)

Image a shows a brown colored beverage in a glass with condensation on the outside. Image b shows a body of water with fog hovering above the surface of the water.

We can also liquefy many gases by compressing them, if the temperature is not too high. The increased pressure brings the molecules of a gas closer together, such that the attractions between the molecules become strong relative to their KE. Consequently, they form liquids. Butane, C_4H_{10}, is the fuel used in disposable lighters and is a gas at standard temperature and pressure. Inside the lighter's fuel compartment, the butane is compressed to a pressure that results in its condensation to the liquid state, as shown in Figure **9.2.3**.

Figure **9.2.3**: Gaseous butane is compressed within the storage compartment of a disposable lighter, resulting in its condensation to the liquid state. (credit: modification of work by "Sam-Cat"/Flickr)

Finally, if the temperature of a liquid becomes sufficiently low, or the pressure on the liquid becomes sufficiently high, the molecules of the liquid no longer have enough KE to overcome the IMF between them, and a solid forms. A more thorough discussion of these and other changes of state, or phase transitions, is provided in a later module of this chapter.

Forces between Molecules

Under appropriate conditions, the attractions between all gas molecules will cause them to form liquids or solids. This is due to intermolecular forces, not *intra*molecular forces. *Intra*molecular forces are those *within* the molecule that keep the molecule

together, for example, the bonds between the atoms. *Inter*molecular forces are the attractions *between* molecules, which determine many of the physical properties of a substance. Figure **9.2.4** illustrates these different molecular forces. The strengths of these attractive forces vary widely, though usually the IMFs between small molecules are weak compared to the intramolecular forces that bond atoms together within a molecule. For example, to overcome the IMFs in one mole of liquid HCl and convert it into gaseous HCl requires only about 17 kilojoules. However, to break the covalent bonds between the hydrogen and chlorine atoms in one mole of HCl requires about 25 times more energy—430 kilojoules.

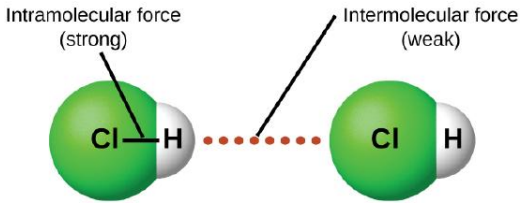

Figure **9.2.4**: Intramolecular forces keep a molecule intact. Intermolecular forces hold multiple molecules together and determine many of a substance's properties.

An image is shown in which two molecules composed of a green sphere labeled "C l" connected on the right to a white sphere labeled "H" are near one another with a dotted line labeled "Intermolecular force (weak)" drawn between them. A line connects the two spheres in each molecule and the line is labeled "Intramolecular force (strong)."

All of the attractive forces between neutral atoms and molecules are known as van der Waals forces, although they are usually referred to more informally as intermolecular attraction. We will consider the various types of IMFs in the next three sections of this module.

Dispersion Forces

One of the three van der Waals forces is present in all condensed phases, regardless of the nature of the atoms or molecules composing the substance. This attractive force is called the London dispersion force in honor of German-born American physicist Fritz London who, in 1928, first explained it. This force is often referred to as simply the dispersion force. Because the electrons of an atom or molecule are in constant motion (or, alternatively, the electron's location is subject to quantum-mechanical variability), at any moment in time, an atom or molecule can develop a temporary, instantaneous dipole if its electrons are distributed asymmetrically. The presence of this dipole can, in turn, distort the electrons of a neighboring atom or molecule, producing an induced dipole. These two rapidly fluctuating, temporary dipoles thus result in a relatively weak electrostatic attraction between the species—a so-called dispersion force like that illustrated in Figure **9.2.5**.

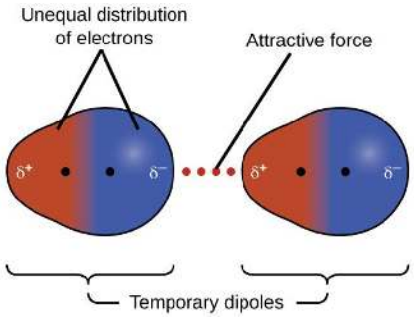

Figure **9.2.5**: Dispersion forces result from the formation of temporary dipoles, as illustrated here for two nonpolar diatomic molecules.

Two pairs of molecules are shown where each molecule has one larger blue side labeled "delta sign, negative sign" and a smaller red side labeled "delta sign, positive sign." Toward the middle of the both molecules, but still on each distinct side, is a black dot. Between the two images is a dotted line labeled, "Attractive force." In the first image, the red and blue sides are labeled, "Unequal distribution of electrons." Below both images are brackets. The brackets are labeled, "Temporary dipoles."

Dispersion forces that develop between atoms in different molecules can attract the two molecules to each other. The forces are relatively weak, however, and become significant only when the molecules are very close. Larger and heavier atoms and molecules exhibit stronger dispersion forces than do smaller and lighter atoms and molecules. F_2 and Cl_2 are gases at room temperature

(reflecting weaker attractive forces); Br_2 is a liquid, and I_2 is a solid (reflecting stronger attractive forces). Trends in observed melting and boiling points for the halogens clearly demonstrate this effect, as seen in Table **9.2.1**.

Table **9.2.1**: Melting and Boiling Points of the Halogens

Halogen	Molar Mass	Atomic Radius	Melting Point	Boiling Point
fluorine, F_2	38 g/mol	72 pm	53 K	85 K
chlorine, Cl_2	71 g/mol	99 pm	172 K	238 K
bromine, Br_2	160 g/mol	114 pm	266 K	332 K
iodine, I_2	254 g/mol	133 pm	387 K	457 K
astatine, At_2	420 g/mol	150 pm	575 K	610 K

The increase in melting and boiling points with increasing atomic/molecular size may be rationalized by considering how the strength of dispersion forces is affected by the electronic structure of the atoms or molecules in the substance. In a larger atom, the valence electrons are, on average, farther from the nuclei than in a smaller atom. Thus, they are less tightly held and can more easily form the temporary dipoles that produce the attraction. The measure of how easy or difficult it is for another electrostatic charge (for example, a nearby ion or polar molecule) to distort a molecule's charge distribution (its electron cloud) is known as polarizability. A molecule that has a charge cloud that is easily distorted is said to be very polarizable and will have large dispersion forces; one with a charge cloud that is difficult to distort is not very polarizable and will have small dispersion forces.

Example **9.2.1**: London Forces and Their Effects

Order the following compounds of a group 14 element and hydrogen from lowest to highest boiling point: CH_4, SiH_4, GeH_4, and SnH_4. Explain your reasoning.

Solution

Applying the skills acquired in the chapter on chemical bonding and molecular geometry, all of these compounds are predicted to be nonpolar, so they may experience only dispersion forces: the smaller the molecule, the less polarizable and the weaker the dispersion forces; the larger the molecule, the larger the dispersion forces. The molar masses of CH_4, SiH_4, GeH_4, and SnH_4 are approximately 16 g/mol, 32 g/mol, 77 g/mol, and 123 g/mol, respectively. Therefore, CH_4 is expected to have the lowest boiling point and SnH_4 the highest boiling point. The ordering from lowest to highest boiling point is expected to be

$$CH_4 < SiH_4 < GeH_4 < SnH_4$$

A graph of the actual boiling points of these compounds versus the period of the group 14 elements shows this prediction to be correct:

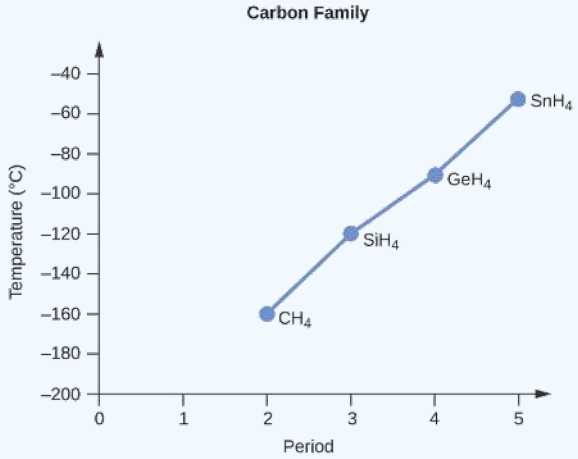

A line graph, titled “Carbon Family,” is shown where the y-axis is labeled “Temperature, (degree sign C)” and has values of “negative 200” to “negative 40” from bottom to top in increments of 20. The x-axis is labeled “Period” and has values of “0” to “5” in increments of 1. The first point on the graph is labeled “C H subscript 4” and is at point “2, negative 160.” The second point on the graph is labeled “S i H subscript 4” and is at point “3, negative 120” while the third point on the graph is labeled “G e H subscript 4” and is at point “4, negative 100.” The fourth point on the graph is labeled “S n H subscript 4” and is at point “5, negative 60.”

? Exercise 9.2.1

Order the following hydrocarbons from lowest to highest boiling point: C_2H_6, C_3H_8, and C_4H_{10}.

Answer

All of these compounds are nonpolar and only have London dispersion forces: the larger the molecule, the larger the dispersion forces and the higher the boiling point. The ordering from lowest to highest boiling point is therefore

$$C_2H_6 < C_3H_8 < C_4H_{10}.$$

The shapes of molecules also affect the magnitudes of the dispersion forces between them. For example, boiling points for the isomers *n*-pentane, isopentane, and neopentane (shown in Figure **9.2.6**) are 36 °C, 27 °C, and 9.5 °C, respectively. Even though these compounds are composed of molecules with the same chemical formula, C_5H_{12}, the difference in boiling points suggests that dispersion forces in the liquid phase are different, being greatest for *n*-pentane and least for neopentane. The elongated shape of *n*-pentane provides a greater surface area available for contact between molecules, resulting in correspondingly stronger dispersion forces. The more compact shape of isopentane offers a smaller surface area available for intermolecular contact and, therefore, weaker dispersion forces. Neopentane molecules are the most compact of the three, offering the least available surface area for intermolecular contact and, hence, the weakest dispersion forces. This behavior is analogous to the connections that may be formed between strips of VELCRO brand fasteners: the greater the area of the strip’s contact, the stronger the connection.

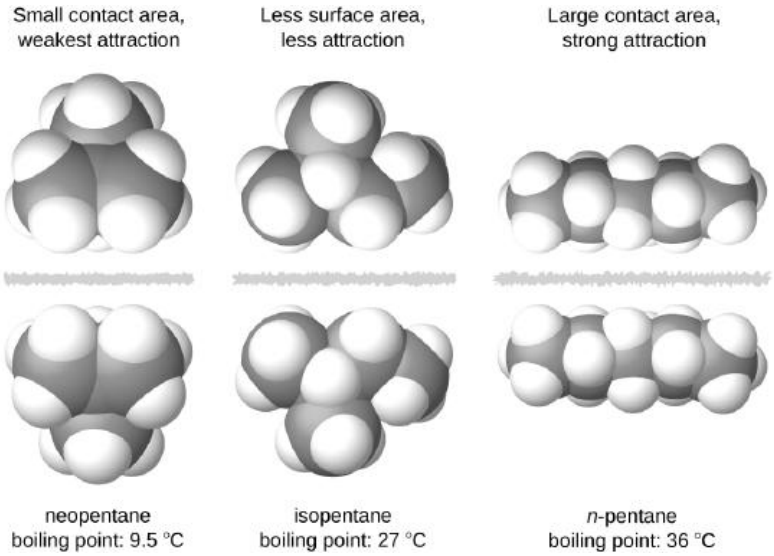

Figure **9.2.6**: The strength of the dispersion forces increases with the contact area between molecules, as demonstrated by the boiling points of these pentane isomers.

Three images of molecules are shown. The first shows a cluster of large, gray spheres each bonded together and to several smaller, white spheres. There is a gray, jagged line and then the mirror image of the first cluster of spheres is shown. Above these two clusters is the label, “Small contact area, weakest attraction,” and below is the label, “neopentane boiling point: 9.5 degrees C.” The second shows a chain of three gray spheres bonded by the middle sphere to a fourth gray sphere. Each gray sphere is bonded to several smaller, white spheres. There is a jagged, gray line and then the mirror image of the first chain appears. Above these two chains is the label, “Less surface area, less attraction,” and below is the label, “isopentane boiling point: 27 degrees C.” The third image shows a chain of five gray spheres bonded together and to several smaller, white spheres. There is a jagged gray line and then the mirror image of the first chain appears. Above these chains is the label, “Large contact area, strong attraction,” and below is the label, “n-pentane boiling point 36 degrees C.”

Applications: Geckos and Intermolecular Forces

Geckos have an amazing ability to adhere to most surfaces. They can quickly run up smooth walls and across ceilings that have no toe-holds, and they do this without having suction cups or a sticky substance on their toes. And while a gecko can lift its feet easily as it walks along a surface, if you attempt to pick it up, it sticks to the surface. How are geckos (as well as spiders and some other insects) able to do this? Although this phenomenon has been investigated for hundreds of years, scientists only recently uncovered the details of the process that allows geckos’ feet to behave this way.

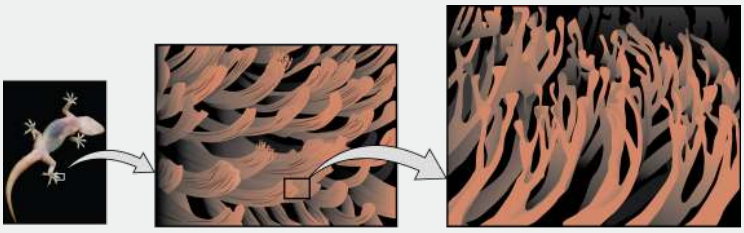

Figure **9.2.7**: Geckos’ toes contain large numbers of tiny hairs (setae), which branch into many triangular tips (spatulae). Geckos adhere to surfaces because of van der Waals attractions between the surface and a gecko’s millions of spatulae. By changing how the spatulae contact the surface, geckos can turn their stickiness “on” and “off.” (credit photo: modification of work by “JC*+A!”/Flickr)

Three figures are shown. The first is a photo of the bottom of a gecko’s foot. The second is bigger version which shows the setae. The third is a bigger version of the setae and shows the spatulae.

Geckos’ toes are covered with hundreds of thousands of tiny hairs known as *setae*, with each seta, in turn, branching into hundreds of tiny, flat, triangular tips called *spatulae*. The huge numbers of spatulae on its setae provide a gecko, shown in Figure **9.2.7**, with a large total surface area for sticking to a surface. In 2000, Kellar Autumn, who leads a multi-institutional gecko research team, found that geckos adhered equally well to both polar silicon dioxide and nonpolar gallium arsenide. This proved that geckos stick to surfaces because of dispersion forces—weak intermolecular attractions arising from temporary,

synchronized charge distributions between adjacent molecules. Although dispersion forces are very weak, the total attraction over millions of spatulae is large enough to support many times the gecko's weight.

In 2014, two scientists developed a model to explain how geckos can rapidly transition from "sticky" to "non-sticky." Alex Greaney and Congcong Hu at Oregon State University described how geckos can achieve this by changing the angle between their spatulae and the surface. Geckos' feet, which are normally nonsticky, become sticky when a small shear force is applied. By curling and uncurling their toes, geckos can alternate between sticking and unsticking from a surface, and thus easily move across it. Further investigations may eventually lead to the development of better adhesives and other applications.

Watch this video to learn more about Kellar Autumn's research that determined that van der Waals forces are responsible for a gecko's ability to cling and climb.

Dipole-Dipole Attractions

Recall from the chapter on chemical bonding and molecular geometry that *polar* molecules have a partial positive charge on one side and a partial negative charge on the other side of the molecule—a separation of charge called a *dipole*. Consider a polar molecule such as hydrogen chloride, HCl. In the HCl molecule, the more electronegative Cl atom bears the partial negative charge, whereas the less electronegative H atom bears the partial positive charge. An attractive force between HCl molecules results from the attraction between the positive end of one HCl molecule and the negative end of another. This attractive force is called a dipole-dipole attraction—the electrostatic force between the partially positive end of one polar molecule and the partially negative end of another, as illustrated in Figure 9.2.8.

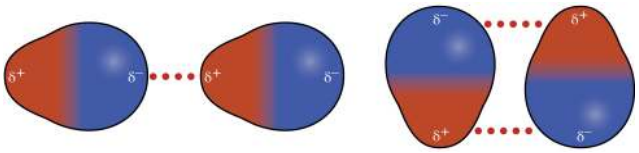

Figure 9.2.8: This image shows two arrangements of polar molecules, such as HCl, that allow an attraction between the partial negative end of one molecule and the partial positive end of another.

Two pairs of molecules are shown where each molecule has one larger blue side labeled "delta sign, negative sign" and a smaller red side labeled "delta sign, positive sign. In the first pair, the red sides of the two molecules both face to the left and the blue side to the right. A horizontal dotted line lies in between the two. In the second pair, the molecules face up and down, with the red and blue ends aligning. A horizontal dotted line lies between the red and blue ends facing upward and another lies between the red and blue ends facing downward.

The effect of a dipole-dipole attraction is apparent when we compare the properties of HCl molecules to nonpolar F_2 molecules. Both HCl and F_2 consist of the same number of atoms and have approximately the same molecular mass. At a temperature of 150 K, molecules of both substances would have the same average KE. However, the dipole-dipole attractions between HCl molecules are sufficient to cause them to "stick together" to form a liquid, whereas the relatively weaker dispersion forces between nonpolar F_2 molecules are not, and so this substance is gaseous at this temperature. The higher normal boiling point of HCl (188 K) compared to F_2 (85 K) is a reflection of the greater strength of dipole-dipole attractions between HCl molecules, compared to the

attractions between nonpolar F_2 molecules. We will often use values such as boiling or freezing points, or enthalpies of vaporization or fusion, as indicators of the relative strengths of IMFs of attraction present within different substances.

Example 9.2.2: Dipole-Dipole Forces and Their Effects

Predict which will have the higher boiling point: N_2 or CO. Explain your reasoning.

Solution

CO and N_2 are both diatomic molecules with masses of about 28 amu, so they experience similar London dispersion forces. Because CO is a polar molecule, it experiences dipole-dipole attractions. Because N_2 is nonpolar, its molecules cannot exhibit dipole-dipole attractions. The dipole-dipole attractions between CO molecules are comparably stronger than the dispersion forces between nonpolar N_2 molecules, so CO is expected to have the higher boiling point.

A common method for preparing oxygen is the decomposition

Exercise 9.2.2

Predict which will have the higher boiling point: **ICl** or $\mathbf{Br_2}$. Explain your reasoning.

Answer

ICl. ICl and Br_2 have similar masses (~160 amu) and therefore experience similar London dispersion forces. ICl is polar and thus also exhibits dipole-dipole attractions; Br_2 is nonpolar and does not. The relatively stronger dipole-dipole attractions require more energy to overcome, so ICl will have the higher boiling point.

Hydrogen Bonding

Nitrosyl fluoride (ONF, molecular mass 49 amu) is a gas at room temperature. Water (H_2O, molecular mass 18 amu) is a liquid, even though it has a lower molecular mass. We clearly cannot attribute this difference between the two compounds to dispersion forces. Both molecules have about the same shape and ONF is the heavier and larger molecule. It is, therefore, expected to experience more significant dispersion forces. Additionally, we cannot attribute this difference in boiling points to differences in the dipole moments of the molecules. Both molecules are polar and exhibit comparable dipole moments. The large difference between the boiling points is due to a particularly strong dipole-dipole attraction that may occur when a molecule contains a hydrogen atom bonded to a fluorine, oxygen, or nitrogen atom (the three most electronegative elements). The very large difference in electronegativity between the H atom (2.1) and the atom to which it is bonded (4.0 for an F atom, 3.5 for an O atom, or 3.0 for a N atom), combined with the very small size of a H atom and the relatively small sizes of F, O, or N atoms, leads to *highly concentrated partial charges* with these atoms. Molecules with F-H, O-H, or N-H moieties are very strongly attracted to similar moieties in nearby molecules, a particularly strong type of dipole-dipole attraction called hydrogen bonding. Examples of hydrogen bonds include HF⋯HF, H_2O⋯HOH, and H_3N⋯HNH_2, in which the hydrogen bonds are denoted by dots. Figure 9.2.9 illustrates hydrogen bonding between water molecules.

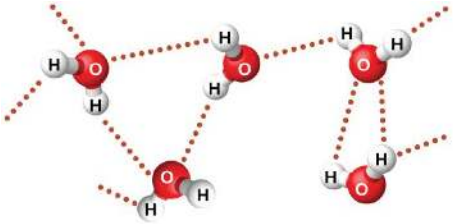

Figure 9.2.9: Water molecules participate in multiple hydrogen-bonding interactions with nearby water molecules.

Five water molecules are shown near one another, but not touching. A dotted line lies between many of the hydrogen atoms on one molecule and the oxygen atom on another molecule.

Despite use of the word “bond,” keep in mind that hydrogen bonds are *intermolecular* attractive forces, not *intramolecular* attractive forces (covalent bonds). Hydrogen bonds are much weaker than covalent bonds, only about 5 to 10% as strong, but are

generally much stronger than other dipole-dipole attractions and dispersion forces.

Hydrogen bonds have a pronounced effect on the properties of condensed phases (liquids and solids). For example, consider the trends in boiling points for the binary hydrides of group 15 (NH_3, PH_3, AsH_3, and SbH_3), group 16 hydrides (H_2O, H_2S, H_2Se, and H_2Te), and group 17 hydrides (HF, HCl, HBr, and HI). The boiling points of the heaviest three hydrides for each group are plotted in Figure **9.2.10**. As we progress down any of these groups, the polarities of the molecules decrease slightly, whereas the sizes of the molecules increase substantially. The effect of increasingly stronger dispersion forces dominates that of increasingly weaker dipole-dipole attractions, and the boiling points are observed to increase steadily. For the group 15, 16, and 17 hydrides, the boiling points for each class of compounds increase with increasing molecular mass for elements in periods 3, 4, and 5.

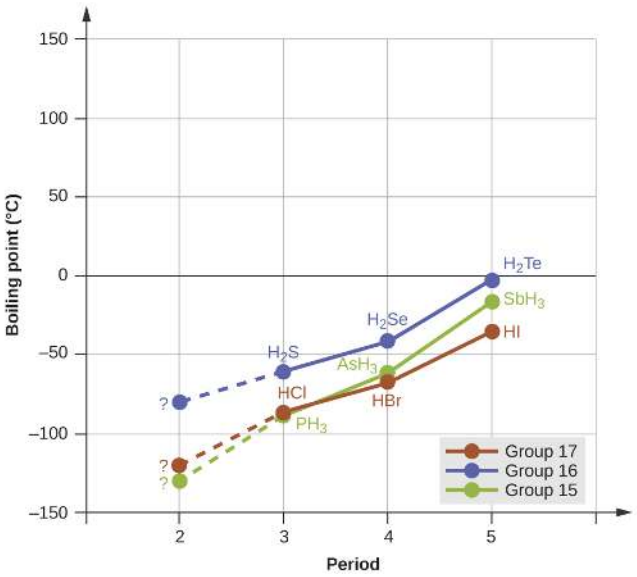

Figure **9.2.10**: In comparison to periods 3−5, the binary hydrides of period 2 elements in groups 17, 16 and 15 (F, O and N, respectively) exhibit anomalously high boiling points due to hydrogen bonding.

A line graph is shown where the y-axis is labeled “Boiling point (, degree sign, C)” and has values of “ negative 150” to “150” from bottom to top in increments of 50. The x-axis is labeled “Period” and has values of “0” to “5” in increments of 1. Three lines are shown on the graph and are labeled in the legend. The red line is labeled as “halogen family,” the blue is “oxygen family” and the green is “nitrogen family.” The first point on the red line is labeled “question mark” and is at point “2, negative 120”. The second point on the line is labeled “H C l” and is at point “3, negative 80” while the third point on the line is labeled “H B r” and is at point “4, negative 60”. The fourth point on the line is labeled “H I” and is at point “5, negative 40.” The first point on the green line is labeled “question mark” and is at point “2, negative 125.” The second point on the line is labeled “P H, subscript 3” and is at point “3, negative 80” while the third point on the line is labeled “A s H, subscript 3” and is at point “4, negative 55.” The fourth point on the line is labeled “S b H, subscript 3” and is at point “5, negative 10.” The first point on the blue line is labeled “question mark” and is at point “2, negative 80.” The second point on the line is labeled “H, subscript 2, S” and is at point “3, negative 55” while the third point on the line is labeled “H, subscript 2, S e” and is at point “4, negative 45.” The fourth point on the line is labeled “H, subscript 2, T e” and is at point “5, negative 3.”

If we use this trend to predict the boiling points for the lightest hydride for each group, we would expect NH_3 to boil at about −120 °C, H_2O to boil at about −80 °C, and HF to boil at about −110 °C. However, when we measure the boiling points for these compounds, we find that they are dramatically higher than the trends would predict, as shown in Figure **9.2.10**. The stark contrast between our naïve predictions and reality provides compelling evidence for the strength of hydrogen bonding.

✔ Example 9.2.3: Effect of Hydrogen Bonding on Boiling Points

Consider the compounds dimethylether (CH_3OCH_3), ethanol (CH_3CH_2OH), and propane ($CH_3CH_2CH_3$). Their boiling points, not necessarily in order, are −42.1 °C, −24.8 °C, and 78.4 °C. Match each compound with its boiling point. Explain your reasoning.

Solution

The VSEPR-predicted shapes of CH_3OCH_3, CH_3CH_2OH, and $CH_3CH_2CH_3$ are similar, as are their molar masses (46 g/mol, 46 g/mol, and 44 g/mol, respectively), so they will exhibit similar dispersion forces. Since $CH_3CH_2CH_3$ is nonpolar, it may

exhibit *only* dispersion forces. Because CH_3OCH_3 is polar, it will also experience dipole-dipole attractions. Finally, CH_3CH_2OH has an −OH group, and so it will experience the uniquely strong dipole-dipole attraction known as hydrogen bonding. So the ordering in terms of strength of IMFs, and thus boiling points, is $CH_3CH_2CH_3 < CH_3OCH_3 < CH_3CH_2OH$. The boiling point of propane is −42.1 °C, the boiling point of dimethylether is −24.8 °C, and the boiling point of ethanol is 78.5 °C.

? Exercise 9.2.3

Ethane (CH_3CH_3) has a melting point of −183 °C and a boiling point of −89 °C. Predict the melting and boiling points for methylamine (CH_3NH_2). Explain your reasoning.

Answer

The melting point and boiling point for methylamine are predicted to be significantly greater than those of ethane. CH_3CH_3 and CH_3NH_2 are similar in size and mass, but methylamine possesses an −NH group and therefore may exhibit hydrogen bonding. This greatly increases its IMFs, and therefore its melting and boiling points. It is difficult to predict values, but the known values are a melting point of −93 °C and a boiling point of −6 °C.

Hydrogen Bonding and DNA

Deoxyribonucleic acid (DNA) is found in every living organism and contains the genetic information that determines the organism's characteristics, provides the blueprint for making the proteins necessary for life, and serves as a template to pass this information on to the organism's offspring. A DNA molecule consists of two (anti-)parallel chains of repeating nucleotides, which form its well-known double helical structure, as shown in Figure **9.2.10**.

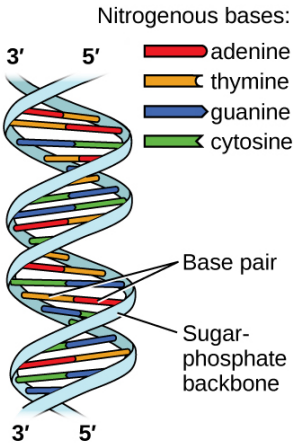

Figure 9.2.11: Two separate DNA molecules form a double-stranded helix in which the molecules are held together via hydrogen bonding. (credit: modification of work by Jerome Walker, Dennis Myts)

Two images are shown. The first lies on the left side of the page and shows a helical structure like a twisted ladder where the rungs of the ladder, labeled “Base pair” are red, yellow, green and blue paired bars. The red and yellow bars, which are always paired together, are labeled in the legend, which is titled “Nitrogenous bases” as “adenine” and “thymine,” respectively. The blue and green bars, which are always paired together, are labeled in the legend as “guanine” and “cytosine,” respectively. At the top of the helical structure, the left-hand side rail, or “Sugar, dash, phosphate backbone,” is labeled as “3, prime” while the right is labeled as “5, prime.” These labels are reversed at the bottom of the helix. To the right of the page is a large Lewis structure. The top left corner of this structure, labeled “5, prime,” shows a phosphorus atom single bonded to three oxygen atoms, one of which has a superscripted negative charge, and double bonded to a fourth oxygen atom. One of the single bonded oxygen atoms is single bonded to the left corner of a five-membered ring with an oxygen atom at its top point and which is single bonded to an oxygen atom on the bottom left. This oxygen atom is single bonded to a phosphorus atom that is single bonded to two other hydrogen atoms and double bonded to a fourth oxygen atom. The lower left of these oxygen atoms is single bonded to another oxygen atom that is single bonded to a five-membered ring with an oxygen in the upper bonding site. The bottom left of this ring has a hydroxyl group attached to it while the upper right carbon is single bonded to a nitrogen atom that is part of a five-membered ring bonded to a six-membered ring. Both of these rings have points of unsaturation and nitrogen atoms bonded into their structures. On the right side of the six-membered ring are two single bonded amine groups and a double bonded oxygen. Three separate dotted lines extend from these sites to corresponding sites on a second six-membered ring. This ring has points of unsaturation and a nitrogen atom in the bottom right bonding position that is single bonded to a five-membered ring on the right side of the image. This ring is single bonded to a carbon that is single bonded to an oxygen that is single bonded to a phosphorus. The phosphorus is single bonded to two other oxygen atoms and double bonded to a fourth oxygen atom. This group is labeled “5, prime.” The five-membered ring is also bonded on the top side to an oxygen that is bonded to a phosphorus single bonded to two other oxygen atoms and double bonded to a fourth oxygen atom. The upper left oxygen of this group is single bonded to a carbon that is single bonded to a five-membered ring with an oxygen in the bottom bonding position. This ring has a hydroxyl group on its upper right side that is labeled “3, prime” and is bonded on the left side to a nitrogen that is a member of a five-membered ring. This ring is bonded to a six-membered ring and both have points of unsaturation. This ring has a nitrogen on the left side, as well as an amine group, that have two dotted lines leading from them to an oxygen and amine group on a six membered ring. These dotted lines are labeled “Hydrogen bonds.” The six membered ring also has a double bonded oxygen on its lower side and a nitrogen atom on its left side that is single bonded to a five-membered ring. This ring connects to the two phosphate groups mentioned at the start of this to form a large circle. The name “guanine” is written below the lower left side of this image while the name “cytosine” is written on the lower right. The name “thymine” is written above the right side of the image and “adenine” is written on the top right. Three sections are indicated below the images where the left is labeled “Sugar, dash, phosphate backbone,” the middle is labeled “Bases” and the right is labeled “Sugar, dash, phosphate backbone.”

Each nucleotide contains a (deoxyribose) sugar bound to a phosphate group on one side, and one of four nitrogenous bases on the other. Two of the bases, cytosine (C) and thymine (T), are single-ringed structures known as pyrimidines. The other two, adenine (A) and guanine (G), are double-ringed structures called purines. These bases form complementary base pairs consisting of one purine and one pyrimidine, with adenine pairing with thymine, and cytosine with guanine. Each base pair is held together by hydrogen bonding. A and T share two hydrogen bonds, C and G share three, and both pairings have a similar shape and structure Figure 9.2.12

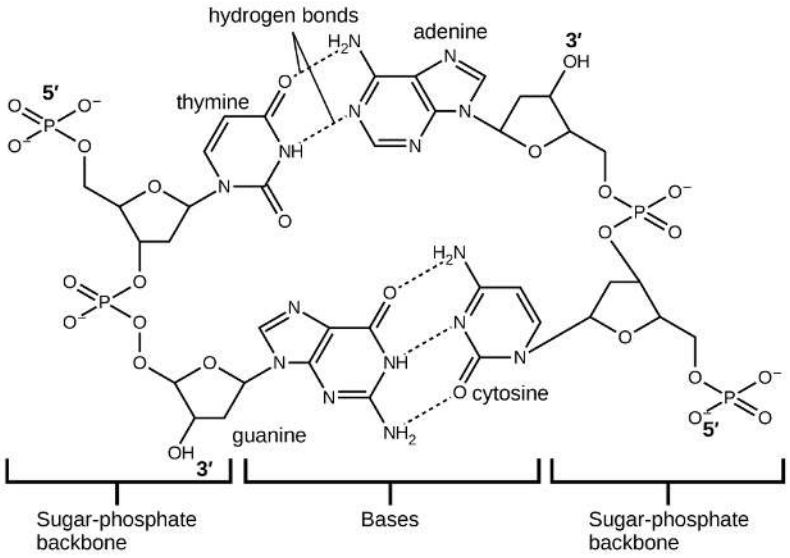

Figure 9.2.12: The geometries of the base molecules result in maximum hydrogen bonding between adenine and thymine (AT) and between guanine and cytosine (GC), so-called "complementary base pairs."

A large Lewis structure is shown. The top left corner of this structure, labeled "5, prime," shows a phosphorus atom single bonded to three oxygen atoms, one of which has a superscripted negative charge, and double bonded to a fourth oxygen atom. One of the single bonded oxygen atoms is single bonded to the left corner of a five-membered ring with an oxygen atom at its top point and which is single bonded to an oxygen atom on the bottom left. This oxygen atom is single bonded to a phosphorus atom that is single bonded to two other hydrogen atoms and double bonded to a fourth oxygen atom. The lower left of these oxygen atoms is single bonded to another oxygen atom that is single bonded to a five-membered ring with an oxygen in the upper bonding site. The bottom left of this ring has a hydroxyl group attached to it while the upper right carbon is single bonded to a nitrogen atom that is part of a five-membered ring bonded to a six-membered ring. Both of these rings have points of unsaturation and nitrogen atoms bonded into their structures. On the right side of the six-membered ring are two single bonded amine groups and a double bonded oxygen. Three separate dotted lines extend from these sites to corresponding sites on a second six-membered ring. This ring has points of unsaturation and a nitrogen atom in the bottom right bonding position that is single bonded to a five-membered ring on the right side of the image. This ring is single bonded to a carbon that is single bonded to an oxygen that is single bonded to a phosphorus. The phosphorus is single bonded to two other oxygen atoms and double bonded to a fourth oxygen atom. This group is labeled "5, prime." The five-membered ring is also bonded on the top side to an oxygen that is bonded to a phosphorus single bonded to two other oxygen atoms and double bonded to a fourth oxygen atom. The upper left oxygen of this group is single bonded to a carbon that is single bonded to a five-membered ring with an oxygen in the bottom bonding position. This ring has a hydroxyl group on its upper right side that is labeled "3, prime" and is bonded on the left side to a nitrogen that is a member of a five-membered ring. This ring is bonded to a six-membered ring and both have points of unsaturation. This ring has a nitrogen on the left side, as well as an amine group, that have two dotted lines leading from them to an oxygen and amine group on a six membered ring. These dotted lines are labeled "Hydrogen bonds." The six membered ring also has a double bonded oxygen on its lower side and a nitrogen atom on its left side that is single bonded to a five-membered ring. This ring connects to the two phosphate groups mentioned at the start of this to form a large circle. The name "guanine" is written below the lower left side of this image while the name "cytosine" is written on the lower right. The name "thymine" is written above the right side of the image and "adenine" is written on the top right. Three sections are indicated below the images where the left is labeled "Sugar, dash, phosphate backbone," the middle is labeled "Bases" and the right is labeled "Sugar, dash, phosphate backbone."

The cumulative effect of millions of hydrogen bonds effectively holds the two strands of DNA together. Importantly, the two strands of DNA can relatively easily "unzip" down the middle since hydrogen bonds are relatively weak compared to the covalent bonds that hold the atoms of the individual DNA molecules together. This allows both strands to function as a template for replication.

Summary

The physical properties of condensed matter (liquids and solids) can be explained in terms of the kinetic molecular theory. In a liquid, intermolecular attractive forces hold the molecules in contact, although they still have sufficient kinetic energy to move past each other. Intermolecular attractive forces, collectively referred to as van der Waals forces, are responsible for the behavior of liquids and solids and are electrostatic in nature. Dipole-dipole attractions result from the electrostatic attraction of the partial negative end of one dipolar molecule for the partial positive end of another. The temporary dipole that results from the motion of the electrons in an atom can induce a dipole in an adjacent atom and give rise to the London dispersion force. London forces

increase with increasing molecular size. Hydrogen bonds are a special type of dipole-dipole attraction that results when hydrogen is bonded to one of the three most electronegative elements: F, O, or N.

Glossary

dipole-dipole attraction
intermolecular attraction between two permanent dipoles

dispersion force
(also, London dispersion force) attraction between two rapidly fluctuating, temporary dipoles; significant only when particles are very close together

hydrogen bonding
occurs when exceptionally strong dipoles attract; bonding that exists when hydrogen is bonded to one of the three most electronegative elements: F, O, or N

induced dipole
temporary dipole formed when the electrons of an atom or molecule are distorted by the instantaneous dipole of a neighboring atom or molecule

instantaneous dipole
temporary dipole that occurs for a brief moment in time when the electrons of an atom or molecule are distributed asymmetrically

intermolecular force
noncovalent attractive force between atoms, molecules, and/or ions

polarizability
measure of the ability of a charge to distort a molecule's charge distribution (electron cloud)

van der Waals force
attractive or repulsive force between molecules, including dipole-dipole, dipole-induced dipole, and London dispersion forces; does not include forces due to covalent or ionic bonding, or the attraction between ions and molecules

---

This page titled 9.2: Intermolecular Forces is shared under a CC BY license and was authored, remixed, and/or curated by OpenStax.

- **10.2: Intermolecular Forces** by OpenStax is licensed CC BY 4.0. Original source: https://openstax.org/details/books/chemistry-2e.

9.3: Properties of Liquids

Learning Objectives

- Distinguish between adhesive and cohesive forces
- Define viscosity, surface tension, and capillary rise
- Describe the roles of intermolecular attractive forces in each of these properties/phenomena

When you pour a glass of water, or fill a car with gasoline, you observe that water and gasoline flow freely. But when you pour syrup on pancakes or add oil to a car engine, you note that syrup and motor oil do not flow as readily. The viscosity of a liquid is a measure of its resistance to flow. Water, gasoline, and other liquids that flow freely have a low viscosity. Honey, syrup, motor oil, and other liquids that do not flow freely, like those shown in Figure **9.3.1**, have higher viscosities. We can measure viscosity by measuring the rate at which a metal ball falls through a liquid (the ball falls more slowly through a more viscous liquid) or by measuring the rate at which a liquid flows through a narrow tube (more viscous liquids flow more slowly).

Figure **9.3.1**: (a) Honey and (b) motor oil are examples of liquids with high viscosities; they flow slowly. (credit a: modification of work by Scott Bauer; credit b: modification of work by David Nagy)

Two photographs are shown and labeled “a” and “b.” Photo a shows a jar of honey with a dipper drizzling it onto a biscuit. More biscuits are shown in a basket in the background. Photo b shows the engine of a car and a person adding motor oil to the engine.

The IMFs between the molecules of a liquid, the size and shape of the molecules, and the temperature determine how easily a liquid flows. As Table **9.3.1** shows, the more structurally complex are the molecules in a liquid and the stronger the IMFs between them, the more difficult it is for them to move past each other and the greater is the viscosity of the liquid. As the temperature increases, the molecules move more rapidly and their kinetic energies are better able to overcome the forces that hold them together; thus, the viscosity of the liquid decreases.

Table **9.3.1**: Viscosities of Common Substances at 25 °C

Substance	Formula	Viscosity (mPa·s)
water	H_2O	0.890
mercury	Hg	1.526
ethanol	C_2H_5OH	1.074
octane	C_8H_{18}	0.508
ethylene glycol	$CH_2(OH)CH_2(OH)$	16.1
honey	variable	~2,000–10,000
motor oil	variable	~50–500

The various IMFs between identical molecules of a substance are examples of cohesive forces. The molecules within a liquid are surrounded by other molecules and are attracted equally in all directions by the cohesive forces within the liquid. However, the molecules on the surface of a liquid are attracted only by about one-half as many molecules. Because of the unbalanced molecular

attractions on the surface molecules, liquids contract to form a shape that minimizes the number of molecules on the surface—that is, the shape with the minimum surface area. A small drop of liquid tends to assume a spherical shape, as shown in Figure **9.3.2**, because in a sphere, the ratio of surface area to volume is at a minimum. Larger drops are more greatly affected by gravity, air resistance, surface interactions, and so on, and as a result, are less spherical.

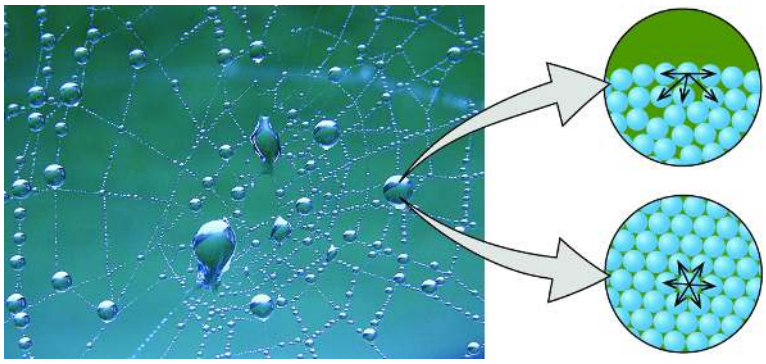

Figure **9.3.2**: Attractive forces result in a spherical water drop that minimizes surface area; cohesive forces hold the sphere together; adhesive forces keep the drop attached to the web. (credit photo: modification of work by "OliBac"/Flickr)

A photo of a spider's web with droplets of water attached to it is shown. Two images are shown the right of the photo and arrows lead from the photo to the images. The upper image shows twenty eight blue spheres stacked one atop the other in the bottom of a circular background. Five arrows are drawn pointing to the sides and downward from the sphere in the top middle of the drawing. The lower image shows another circular background of the same size as the first, but this time the blue spheres fill the image and are packed closely together. A sphere in the middle has six arrows pointing in all directions away from it.

Surface tension is defined as the energy required to increase the surface area of a liquid, or the force required to increase the length of a liquid surface by a given amount. This property results from the cohesive forces between molecules at the surface of a liquid, and it causes the surface of a liquid to behave like a stretched rubber membrane. Surface tensions of several liquids are presented in Table **9.3.2**.

Table **9.3.2**: Surface Tensions of Common Substances at 25 °C

Substance	Formula	Surface Tension (mN/m)
water	H_2O	71.99
mercury	Hg	458.48
ethanol	C_2H_5OH	21.97
octane	C_8H_{18}	21.14
ethylene glycol	$CH_2(OH)CH_2(OH)$	47.99

Among common liquids, water exhibits a distinctly high surface tension due to strong hydrogen bonding between its molecules. As a result of this high surface tension, the surface of water represents a relatively "tough skin" that can withstand considerable force without breaking. A steel needle carefully placed on water will float. Some insects, like the one shown in Figure **9.3.3**, even though they are denser than water, move on its surface because they are supported by the surface tension.



Figure **9.3.3**: Surface tension (right) prevents this insect, a "water strider," from sinking into the water.

A photo and a diagram as shown and a right-facing arrow leads from the photo to the image. The photo shows an insect standing on the surface of a sample of water. The image shows a square background that is two thirds covered in blue spheres that are closely packet together. A brown line starts at the upper left corner of the background and rests on top of the first row of spheres. The sphere directly under this low point of the line has four arrows drawn on it that face to both sides and downward. A sphere in the bottom center of the image has six arrows drawn on it that all face outward in different directions.

The IMFs of attraction between two *different* molecules are called adhesive forces. Consider what happens when water comes into contact with some surface. If the adhesive forces between water molecules and the molecules of the surface are weak compared to the cohesive forces between the water molecules, the water does not "wet" the surface. For example, water does not wet waxed surfaces or many plastics such as polyethylene. Water forms drops on these surfaces because the cohesive forces within the drops are greater than the adhesive forces between the water and the plastic. Water spreads out on glass because the adhesive force between water and glass is greater than the cohesive forces within the water. When water is confined in a glass tube, its meniscus (surface) has a concave shape because the water wets the glass and creeps up the side of the tube. On the other hand, the cohesive forces between mercury atoms are much greater than the adhesive forces between mercury and glass. Mercury therefore does not wet glass, and it forms a convex meniscus when confined in a tube because the cohesive forces within the mercury tend to draw it into a drop (Figure **9.3.4**).



Figure **9.3.4**: Differences in the relative strengths of cohesive and adhesive forces result in different meniscus shapes for mercury (left) and water (right) in glass tubes. (credit: Mark Ott)

This figure shows two test tubes. The test tube on the left contains mercury with a meniscus that rounds up. The test tube on the right contains water with a meniscus that rounds down.

If you place one end of a paper towel in spilled wine, as shown in Figure **9.3.5**, the liquid wicks up the paper towel. A similar process occurs in a cloth towel when you use it to dry off after a shower. These are examples of capillary action—when a liquid flows within a porous material due to the attraction of the liquid molecules to the surface of the material and to other liquid molecules. The adhesive forces between the liquid and the porous material, combined with the cohesive forces within the liquid, may be strong enough to move the liquid upward against gravity.

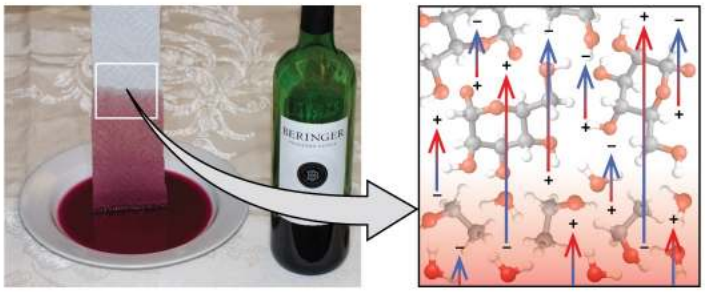

Figure **9.3.5**: Wine wicks up a paper towel (left) because of the strong attractions of water (and ethanol) molecules to the −OH groups on the towel's cellulose fibers and the strong attractions of water molecules to other water (and ethanol) molecules (right). (credit photo: modification of work by Mark Blaser)

A photo and a diagram are shown. In the photo, a paper towel is dipped into a bowl full of a red liquid sitting on a countertop. The red liquid is traveling up the lower part of the paper towel, and this section of the photo has a square drawn around it. A right-facing arrow leads from this square to the image. The image is square and has a background of two types of molecules, mixed together. The first type of molecule is composed of two bonded black spheres, one of which is single bonded to three white spheres and one of which is single bonded to two white spheres and a red sphere that is itself bonded to a white sphere. The other type of molecule is composed of six black spheres bonded together in a row and bonded to other red and white spheres. Six upward-facing arrows are drawn on top of this background. They have positive signs on their lower ends and negative signs on their heads. Four upward-facing arrows are drawn with their signs reversed.

Towels soak up liquids like water because the fibers of a towel are made of molecules that are attracted to water molecules. Most cloth towels are made of cotton, and paper towels are generally made from paper pulp. Both consist of long molecules of cellulose

that contain many −OH groups. Water molecules are attracted to these −OH groups and form hydrogen bonds with them, which draws the H_2O molecules up the cellulose molecules. The water molecules are also attracted to each other, so large amounts of water are drawn up the cellulose fibers.

Capillary action can also occur when one end of a small diameter tube is immersed in a liquid, as illustrated in Figure **9.3.6**. If the liquid molecules are strongly attracted to the tube molecules, the liquid creeps up the inside of the tube until the weight of the liquid and the adhesive forces are in balance. The smaller the diameter of the tube is, the higher the liquid climbs. It is partly by capillary action occurring in plant cells called xylem that water and dissolved nutrients are brought from the soil up through the roots and into a plant. Capillary action is the basis for thin layer chromatography, a laboratory technique commonly used to separate small quantities of mixtures. You depend on a constant supply of tears to keep your eyes lubricated and on capillary action to pump tear fluid away.

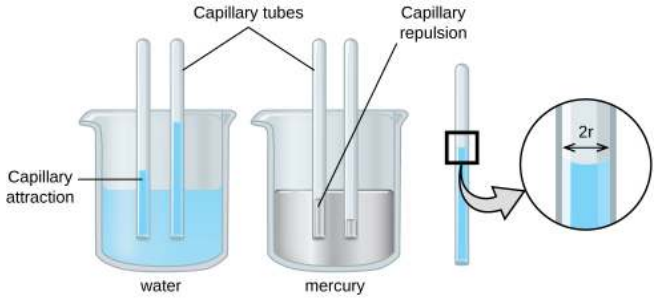

Figure **9.3.6**: Depending upon the relative strengths of adhesive and cohesive forces, a liquid may rise (such as water) or fall (such as mercury) in a glass capillary tube. The extent of the rise (or fall) is directly proportional to the surface tension of the liquid and inversely proportional to the density of the liquid and the radius of the tube.

An image of two beakers and a tube is shown. The first beaker, drawn on the left and labeled “Water,” is drawn half-full of a blue liquid. Two tubes are placed vertically in the beaker and inserted into the liquid. The liquid is shown higher in the tubes than in the beaker and is labeled “Capillary attraction.” The second beaker, drawn in the middle and labeled “Mercury,” is drawn half-full of a gray liquid. Two tubes are placed vertically in the beaker and inserted into the liquid. The liquid is shown lower in the tubes than in the beaker and is labeled “Capillary repulsion.” Lines point to the vertical tubes and label them “Capillary tubes.” A separate drawing of one of the vertical tubes from the first beaker is shown on the right. A right-facing arrow leads from the liquid in the tube to a square call-out box that shows a close-up view of the liquid’s surface. The distance across the tube is labeled “2 r” in this image.

The height to which a liquid will rise in a capillary tube is determined by several factors as shown in the following equation:

$$h = \frac{2T\cos\theta}{r\rho g} \tag{9.3.1}$$

where

- h is the height of the liquid inside the capillary tube relative to the surface of the liquid outside the tube,
- T is the surface tension of the liquid,
- θ is the contact angle between the liquid and the tube,
- r is the radius of the tube, ρ is the density of the liquid, and
- g is the acceleration due to gravity, 9.8 m/s^2.

When the tube is made of a material to which the liquid molecules are strongly attracted, they will spread out completely on the surface, which corresponds to a contact angle of 0°. This is the situation for water rising in a glass tube.

Example 9.3.1: Capillary Rise

At 25 °C, how high will water rise in a glass capillary tube with an inner diameter of 0.25 mm?

For water, T = 71.99 mN/m and ρ = 1.0 g/cm^3.

Solution

The liquid will rise to a height h given by Equation 9.3.1 :

$$h = \frac{2T\cos\theta}{r\rho g}$$

The Newton is defined as a kg m/s^2, and so the provided surface tension is equivalent to 0.07199 kg/s^2. The provided density must be converted into units that will cancel appropriately: ρ = 1000 kg/m^3. The diameter of the tube in meters is 0.00025 m, so the radius is 0.000125 m. For a glass tube immersed in water, the contact angle is θ = 0°, so cos θ = 1. Finally, acceleration due to gravity on the earth is g = 9.8 m/s^2. Substituting these values into the equation, and cancelling units, we have:

$$h = \frac{2(0.07199\ \text{kg/s}^2)}{(0.000125\ \text{m})(1000\ \text{kg/m}^3)(9.8\ \text{m/s}^2)} = 0.12\ \text{m} = 12\ \text{cm}$$

? Exercise 9.3.1

Water rises in a glass capillary tube to a height of 8.4 cm. What is the diameter of the capillary tube?

Answer

diameter = 0.36 mm

Applications: Capillary Action is Used to Draw Blood

Many medical tests require drawing a small amount of blood, for example to determine the amount of glucose in someone with diabetes or the hematocrit level in an athlete. This procedure can be easily done because of capillary action, the ability of a liquid to flow up a small tube against gravity, as shown in Figure 9.3.7. When your finger is pricked, a drop of blood forms and holds together due to surface tension—the unbalanced intermolecular attractions at the surface of the drop. Then, when the open end of a narrow-diameter glass tube touches the drop of blood, the adhesive forces between the molecules in the blood and those at the glass surface draw the blood up the tube. How far the blood goes up the tube depends on the diameter of the tube (and the type of fluid). A small tube has a relatively large surface area for a given volume of blood, which results in larger (relative) attractive forces, allowing the blood to be drawn farther up the tube. The liquid itself is held together by its own cohesive forces. When the weight of the liquid in the tube generates a downward force equal to the upward force associated with capillary action, the liquid stops rising.

Figure 9.3.7:: Blood is collected for medical analysis by capillary action, which draws blood into a small diameter glass tube. (credit: modification of work by Centers for Disease Control and Prevention)

A photograph shows a person’s hand being held by a person wearing medical gloves. A thin glass tube is pressed against the persons finger and blood is moving up the tube.

Key Concepts and Summary

The intermolecular forces between molecules in the liquid state vary depending upon their chemical identities and result in corresponding variations in various physical properties. Cohesive forces between like molecules are responsible for a liquid’s viscosity (resistance to flow) and surface tension (elasticity of a liquid surface). Adhesive forces between the molecules of a liquid and different molecules composing a surface in contact with the liquid are responsible for phenomena such as surface wetting and capillary rise.

Key Equations

- $h = \frac{2T\cos\theta}{r\rho g}$

Glossary

adhesive force
force of attraction between molecules of different chemical identities

capillary action
flow of liquid within a porous material due to the attraction of the liquid molecules to the surface of the material and to other liquid molecules

cohesive force
force of attraction between identical molecules

surface tension
energy required to increase the area, or length, of a liquid surface by a given amount

viscosity
measure of a liquid’s resistance to flow

This page titled 9.3: Properties of Liquids is shared under a CC BY license and was authored, remixed, and/or curated by OpenStax.

- **10.3: Properties of Liquids** by OpenStax is licensed CC BY 4.0. Original source: https://openstax.org/details/books/chemistry-2e.

9.4: Phase Transitions

Learning Objectives

- Define phase transitions and phase transition temperatures
- Explain the relation between phase transition temperatures and intermolecular attractive forces
- Describe the processes represented by typical heating and cooling curves, and compute heat flows and enthalpy changes accompanying these processes

We witness and utilize changes of physical state, or phase transitions, in a great number of ways. As one example of global significance, consider the evaporation, condensation, freezing, and melting of water. These changes of state are essential aspects of our earth's water cycle as well as many other natural phenomena and technological processes of central importance to our lives. In this module, the essential aspects of phase transitions are explored.

Vaporization and Condensation

When a liquid vaporizes in a closed container, gas molecules cannot escape. As these gas phase molecules move randomly about, they will occasionally collide with the surface of the condensed phase, and in some cases, these collisions will result in the molecules re-entering the condensed phase. The change from the gas phase to the liquid is called condensation. When the rate of condensation becomes equal to the rate of vaporization, neither the amount of the liquid nor the amount of the vapor in the container changes. The vapor in the container is then said to be *in equilibrium* with the liquid. Keep in mind that this is not a static situation, as molecules are continually exchanged between the condensed and gaseous phases. Such is an example of a dynamic equilibrium, the status of a system in which reciprocal processes (for example, vaporization and condensation) occur at equal rates. The pressure exerted by the vapor in equilibrium with a liquid in a closed container at a given temperature is called the liquid's vapor pressure (or equilibrium vapor pressure). The area of the surface of the liquid in contact with a vapor and the size of the vessel have no effect on the vapor pressure, although they do affect the time required for the equilibrium to be reached. We can measure the vapor pressure of a liquid by placing a sample in a closed container, like that illustrated in Figure **9.4.1**, and using a manometer to measure the increase in pressure that is due to the vapor in equilibrium with the condensed phase.

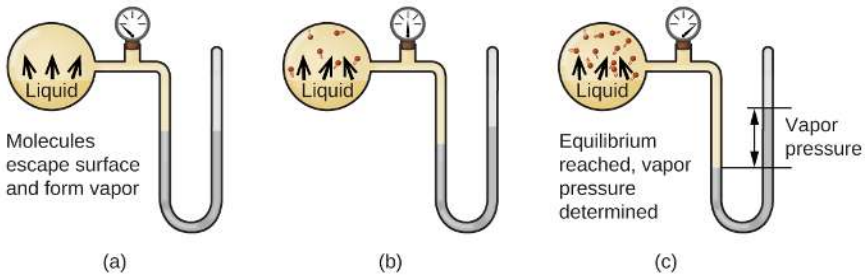

Figure **9.4.1**: In a closed container, dynamic equilibrium is reached when (a) the rate of molecules escaping from the liquid to become the gas (b) increases and eventually (c) equals the rate of gas molecules entering the liquid. When this equilibrium is reached, the vapor pressure of the gas is constant, although the vaporization and condensation processes continue.

The chemical identities of the molecules in a liquid determine the types (and strengths) of intermolecular attractions possible; consequently, different substances will exhibit different equilibrium vapor pressures. Relatively strong intermolecular attractive forces will serve to impede vaporization as well as favoring "recapture" of gas-phase molecules when they collide with the liquid surface, resulting in a relatively low vapor pressure. Weak intermolecular attractions present less of a barrier to vaporization, and a reduced likelihood of gas recapture, yielding relatively high vapor pressures. The following example illustrates this dependence of vapor pressure on intermolecular attractive forces.

Example **9.4.1**: Explaining Vapor Pressure in Terms of IMFs

Given the shown structural formulas for these four compounds, explain their relative vapor pressures in terms of types and extents of IMFs:

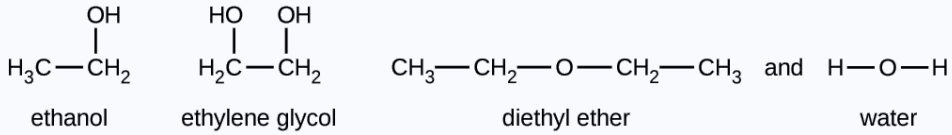

Solution

Diethyl ether has a very small dipole and most of its intermolecular attractions are London forces. Although this molecule is the largest of the four under consideration, its IMFs are the weakest and, as a result, its molecules most readily escape from the liquid. It also has the highest vapor pressure. Due to its smaller size, ethanol exhibits weaker dispersion forces than diethyl ether. However, ethanol is capable of hydrogen bonding and, therefore, exhibits stronger overall IMFs, which means that fewer molecules escape from the liquid at any given temperature, and so ethanol has a lower vapor pressure than diethyl ether. Water is much smaller than either of the previous substances and exhibits weaker dispersion forces, but its extensive hydrogen bonding provides stronger intermolecular attractions, fewer molecules escaping the liquid, and a lower vapor pressure than for either diethyl ether or ethanol. Ethylene glycol has two −OH groups, so, like water, it exhibits extensive hydrogen bonding. It is much larger than water and thus experiences larger London forces. Its overall IMFs are the largest of these four substances, which means its vaporization rate will be the slowest and, consequently, its vapor pressure the lowest.

Exercise 9.4.1

At 20 °C, the vapor pressures of several alcohols are given in this table. Explain these vapor pressures in terms of types and extents of IMFs for these alcohols:

Compound	methanol CH_3OH	ethanol C_2H_5OH	propanol C_3H_7OH	butanol C_4H_9OH
Vapor Pressure at 20 °C	11.9 kPa	5.95 kPa	2.67 kPa	0.56 kPa

Answer

All these compounds exhibit hydrogen bonding; these strong IMFs are difficult for the molecules to overcome, so the vapor pressures are relatively low. As the size of molecule increases from methanol to butanol, dispersion forces increase, which means that the vapor pressures decrease as observed:

$$P_{methanol} > P_{ethanol} > P_{propanol} > P_{butanol} onumber \tag{9.4.1}$$

As temperature increases, the vapor pressure of a liquid also increases due to the increased average KE of its molecules. Recall that at any given temperature, the molecules of a substance experience a range of kinetic energies, with a certain fraction of molecules having a sufficient energy to overcome IMF and escape the liquid (vaporize). At a higher temperature, a greater fraction of molecules have enough energy to escape from the liquid, as shown in Figure **9.4.2**. The escape of more molecules per unit of time and the greater average speed of the molecules that escape both contribute to the higher vapor pressure.

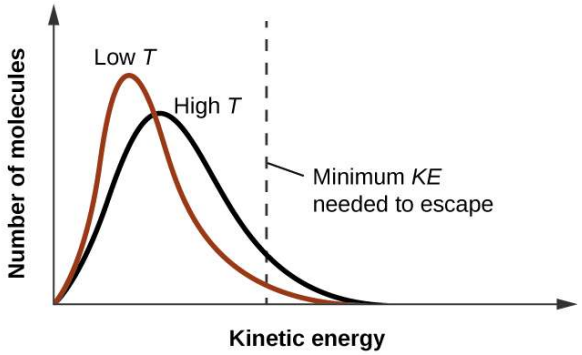

Figure 9.4.2: Temperature affects the distribution of kinetic energies for the molecules in a liquid. At the higher temperature, more molecules have the necessary kinetic energy, KE, to escape from the liquid into the gas phase.

Boiling Points

When the vapor pressure increases enough to equal the external atmospheric pressure, the liquid reaches its boiling point. The boiling point of a liquid is the temperature at which its equilibrium vapor pressure is equal to the pressure exerted on the liquid by its gaseous surroundings. For liquids in open containers, this pressure is that due to the earth's atmosphere. The normal boiling point of a liquid is defined as its boiling point when surrounding pressure is equal to 1 atm (101.3 kPa). Figure 9.4.3 shows the variation in vapor pressure with temperature for several different substances. Considering the definition of boiling point, these curves may be seen as depicting the dependence of a liquid's boiling point on surrounding pressure.

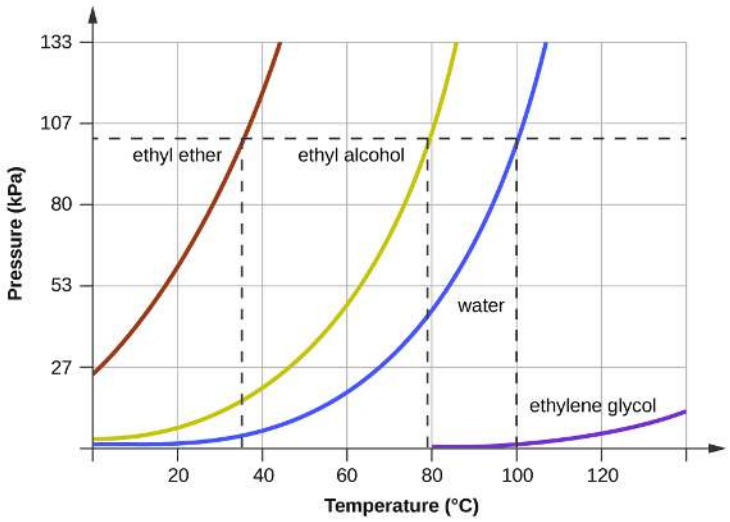

Figure 9.4.3: The boiling points of liquids are the temperatures at which their equilibrium vapor pressures equal the pressure of the surrounding atmosphere. Normal boiling points are those corresponding to a pressure of 1 atm (101.3 kPa.)

Example 9.4.2: A Boiling Point at Reduced Pressure

A typical atmospheric pressure in Leadville, Colorado (elevation 10,200 feet) is 68 kPa. Use the graph in Figure 9.4.3 to determine the boiling point of water at this elevation.

Solution

The graph of the vapor pressure of water versus temperature in Figure 9.4.3 indicates that the vapor pressure of water is 68 kPa at about 90 °C. Thus, at about 90 °C, the vapor pressure of water will equal the atmospheric pressure in Leadville, and water will boil.

Exercise 9.4.2

The boiling point of ethyl ether was measured to be 10 °C at a base camp on the slopes of Mount Everest. Use Figure 9.4.3 to determine the approximate atmospheric pressure at the camp.

Answer

Approximately 40 kPa (0.4 atm)

Enthalpy of Vaporization

Vaporization is an endothermic process. The cooling effect can be evident when you leave a swimming pool or a shower. When the water on your skin evaporates, it removes heat from your skin and causes you to feel cold. The energy change associated with the vaporization process is the enthalpy of vaporization, ΔH_{vap}. For example, the vaporization of water at standard temperature is represented by:

$$\mathrm{H_2O}(l) \longrightarrow \mathrm{H_2O}(g) \quad \Delta H_{\mathrm{vap}} = 44.01\ \mathrm{kJ/mol} \tag{9.4.2}$$

As described in the chapter on thermochemistry, the reverse of an endothermic process is exothermic. And so, the condensation of a gas releases heat:

$$\mathrm{H_2O}(g) \longrightarrow \mathrm{H_2O}(l) \quad \Delta H_{\text{con}} = -\Delta H_{\text{vap}} = -44.01\ \text{kJ/mol} \tag{9.4.3}$$

Example 9.4.5: Using Enthalpy of Vaporization

One way our body is cooled is by evaporation of the water in sweat (Figure 9.4.4). In very hot climates, we can lose as much as 1.5 L of sweat per day. Although sweat is not pure water, we can get an approximate value of the amount of heat removed by evaporation by assuming that it is. How much heat is required to evaporate 1.5 L of water (1.5 kg) at T = 37 °C (normal body temperature); $\Delta H_{vap} = 43.46\ kJ/mol$ at 37 °C.

Figure 9.4.4: Evaporation of sweat helps cool the body. (credit: “Kullez”/Flickr)

Solution We start with the known volume of sweat (approximated as just water) and use the given information to convert to the amount of heat needed:

$$1.5\,\cancel{L} \times \frac{1000\,\cancel{g}}{1\,\cancel{L}} \times \frac{1\,\cancel{\text{mol}}}{18\,\cancel{g}} \times \frac{43.46\ \text{kJ}}{1\,\cancel{\text{mol}}} = 3.6 \times 10^3\ \text{kJ} onumber \tag{9.4.4}$$

Thus, 3600 kJ of heat are removed by the evaporation of 1.5 L of water.

Exercise 9.4.5: Boiling Ammonia

How much heat is required to evaporate 100.0 g of liquid ammonia, $\mathrm{NH_3}$, at its boiling point if its enthalpy of vaporization is 4.8 kJ/mol?

Answer

28 kJ

Melting and Freezing

When we heat a crystalline solid, we increase the average energy of its atoms, molecules, or ions and the solid gets hotter. At some point, the added energy becomes large enough to partially overcome the forces holding the molecules or ions of the solid in their fixed positions, and the solid begins the process of transitioning to the liquid state, or melting. At this point, the temperature of the solid stops rising, despite the continual input of heat, and it remains constant until all of the solid is melted. Only after all of the solid has melted will continued heating increase the temperature of the liquid (Figure 9.4.5.

Figure 9.4.5: (a) This beaker of ice has a temperature of −12.0 °C. (b) After 10 minutes the ice has absorbed enough heat from the air to warm to 0 °C. A small amount has melted. (c) Thirty minutes later, the ice has absorbed more heat, but its temperature is still 0 °C. The ice melts without changing its temperature. (d) Only after all the ice has melted does the heat absorbed cause the temperature to increase to 22.2 °C. (credit: modification of work by Mark Ott).

If we stop heating during melting and place the mixture of solid and liquid in a perfectly insulated container so no heat can enter or escape, the solid and liquid phases remain in equilibrium. This is almost the situation with a mixture of ice and water in a very good thermos bottle; almost no heat gets in or out, and the mixture of solid ice and liquid water remains for hours. In a mixture of solid and liquid at equilibrium, the reciprocal processes of melting and freezing occur at equal rates, and the quantities of solid and liquid therefore remain constant. The temperature at which the solid and liquid phases of a given substance are in equilibrium is called the melting point of the solid or the freezing point of the liquid. Use of one term or the other is normally dictated by the direction of the phase transition being considered, for example, solid to liquid (melting) or liquid to solid (freezing).

The enthalpy of fusion and the melting point of a crystalline solid depend on the strength of the attractive forces between the units present in the crystal. Molecules with weak attractive forces form crystals with low melting points. Crystals consisting of particles with stronger attractive forces melt at higher temperatures.

The amount of heat required to change one mole of a substance from the solid state to the liquid state is the enthalpy of fusion, ΔHfus of the substance. The enthalpy of fusion of ice is 6.0 kJ/mol at 0 °C. Fusion (melting) is an endothermic process:

$$\mathrm{H_2O_{(s)} \rightarrow H_2O_{(l)} \quad \Delta H_{fus} = 6.01\ kJ/mol} \tag{9.4.5}$$

The reciprocal process, freezing, is an exothermic process whose enthalpy change is −6.0 kJ/mol at 0 °C:

$$\mathrm{H_2O_{(l)} \rightarrow H_2O_{(s)} \quad \Delta H_{frz} = -\Delta H_{fus} = -6.01\ kJ/mol} \tag{9.4.6}$$

Sublimation and Deposition

Some solids can transition directly into the gaseous state, bypassing the liquid state, via a process known as sublimation. At room temperature and standard pressure, a piece of dry ice (solid CO_2) sublimes, appearing to gradually disappear without ever forming any liquid. Snow and ice sublime at temperatures below the melting point of water, a slow process that may be accelerated by winds and the reduced atmospheric pressures at high altitudes. When solid iodine is warmed, the solid sublimes and a vivid purple vapor forms (Figure 9.4.6). The reverse of sublimation is called deposition, a process in which gaseous substances condense directly into the solid state, bypassing the liquid state. The formation of frost is an example of deposition.

Figure 9.4.6: Sublimation of solid iodine in the bottom of the tube produces a purple gas that subsequently deposits as solid iodine on the colder part of the tube above. (credit: modification of work by Mark Ott)

Like vaporization, the process of sublimation requires an input of energy to overcome intermolecular attractions. The enthalpy of sublimation, ΔHsub, is the energy required to convert one mole of a substance from the solid to the gaseous state. For example, the sublimation of carbon dioxide is represented by:

$$\mathrm{CO_2}(s) \longrightarrow \mathrm{CO_2}(g) \quad \Delta H_{\text{sub}} = 26.1\ \text{kJ/mol} \tag{9.4.7}$$

Likewise, the enthalpy change for the reverse process of deposition is equal in magnitude but opposite in sign to that for sublimation:

$$\mathrm{CO_2}(g) \longrightarrow \mathrm{CO_2}(s) \quad \Delta H_{\text{dep}} = -\Delta H_{\text{sub}} = -26.1\ \text{kJ/mol} \tag{9.4.8}$$

Consider the extent to which intermolecular attractions must be overcome to achieve a given phase transition. Converting a solid into a liquid requires that these attractions be only partially overcome; transition to the gaseous state requires that they be completely overcome. As a result, the enthalpy of fusion for a substance is less than its enthalpy of vaporization. This same logic can be used to derive an approximate relation between the enthalpies of all phase changes for a given substance. Though not an entirely accurate description, sublimation may be conveniently modeled as a sequential two-step process of melting followed by vaporization in order to apply Hess's Law.

$$\begin{aligned} &\text{solid} \longrightarrow \text{liquid} \quad \Delta H_{\text{fus}} \\ &\underline{\text{liquid} \longrightarrow \text{gas} \quad \Delta H_{\text{vap}}} \\ &\text{solid} \longrightarrow \text{gas} \quad \Delta H_{\text{sub}} = \Delta H_{\text{fus}} + \Delta H_{\text{vap}} \end{aligned} \tag{9.4.9}$$

Viewed in this manner, the enthalpy of sublimation for a substance may be estimated as the sum of its enthalpies of fusion and vaporization, as illustrated in Figure 9.4.7. For example:

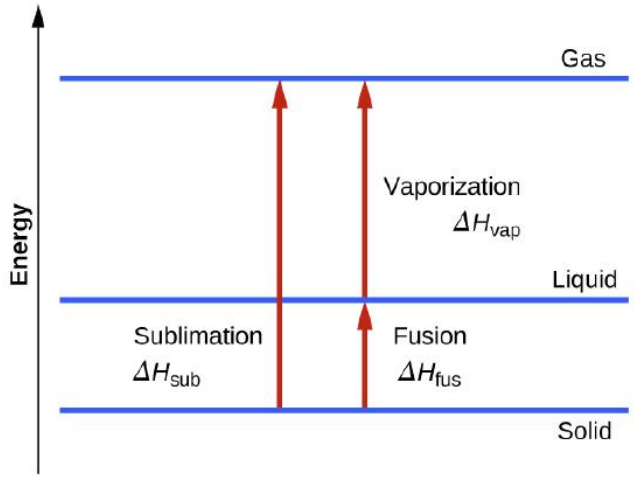

***Figure 9.4.7**: For a given substance, the sum of its enthalpy of fusion and enthalpy of vaporization is approximately equal to its enthalpy of sublimation.*

Heating and Cooling Curves

In the chapter on thermochemistry, the relation between the amount of heat absorbed or related by a substance, q, and its accompanying temperature change, ΔT, was introduced:

$$q = mc\Delta T \tag{9.4.10}$$

where m is the mass of the substance and c is its specific heat. The relation applies to matter being heated or cooled, but not undergoing a change in state. When a substance being heated or cooled reaches a temperature corresponding to one of its phase transitions, further gain or loss of heat is a result of diminishing or enhancing intermolecular attractions, instead of increasing or decreasing molecular kinetic energies. While a substance is undergoing a change in state, its temperature remains constant. Figure 9.4.8 shows a typical heating curve.

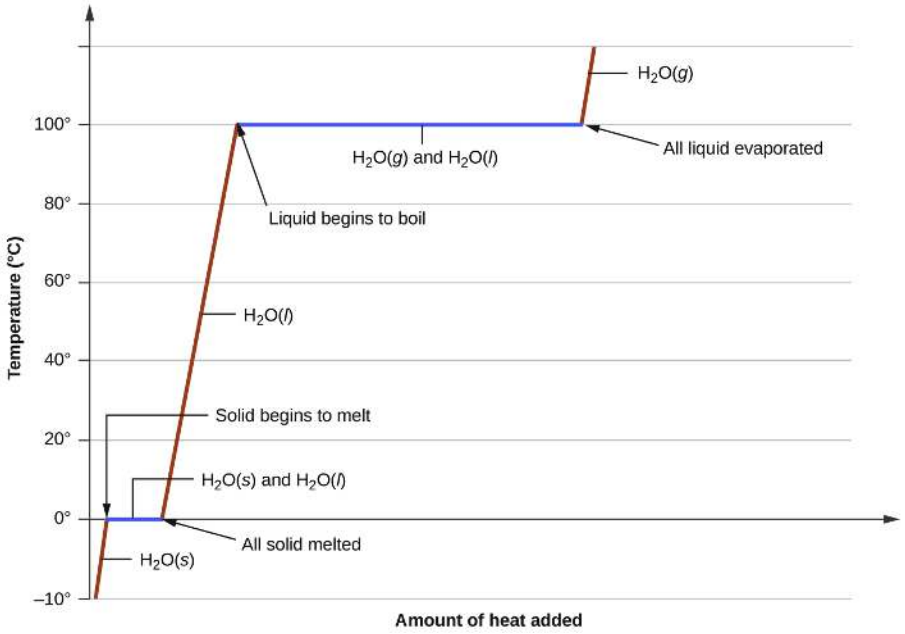

Figure 9.4.8: A typical heating curve for a substance depicts changes in temperature that result as the substance absorbs increasing amounts of heat. Plateaus in the curve (regions of constant temperature) are exhibited when the substance undergoes phase transitions.

Consider the example of heating a pot of water to boiling. A stove burner will supply heat at a roughly constant rate; initially, this heat serves to increase the water's temperature. When the water reaches its boiling point, the temperature remains constant despite the continued input of heat from the stove burner. This same temperature is maintained by the water as long as it is boiling. If the burner setting is increased to provide heat at a greater rate, the water temperature does not rise, but instead the boiling becomes more vigorous (rapid). This behavior is observed for other phase transitions as well: For example, temperature remains constant while the change of state is in progress.

Example 9.4.6: Total Heat Needed to Change Temperature and Phase for a Substance

How much heat is required to convert 135 g of ice at −15 °C into water vapor at 120 °C?

Solution

The transition described involves the following steps:

1. Heat ice from −15 °C to 0 °C
2. Melt ice
3. Heat water from 0 °C to 100 °C
4. Boil water
5. Heat steam from 100 °C to 120 °C

The heat needed to change the temperature of a given substance (with no change in phase) is: $q = m \times c \times \Delta T$ (see previous chapter on thermochemistry). The heat needed to induce a given change in phase is given by $q = n \times \Delta H$.

Using these equations with the appropriate values for specific heat of ice, water, and steam, and enthalpies of fusion and vaporization, we have:

$$q_{\text{total}} = (m \cdot c \cdot \Delta T)_{\text{ice}} + n \cdot \Delta H_{\text{fus}} + (m \cdot c \cdot \Delta T)_{\text{water}} + n \cdot \Delta H_{\text{vap}} + (m \cdot c \cdot \Delta T)_{\text{steam}}$$

$$= (135\ \text{g} \cdot 2.09\ \text{J/g·°C} \cdot 15\text{°C}) + \left(135 \cdot \frac{1\ \text{mol}}{18.02\ \text{g}} \cdot 6.01\ \text{kJ/mol}\right)$$

$$+(135\ \text{g} \cdot 4.18\ \text{J/g·°C} \cdot 100\text{°C}) + \left(135\ \text{g} \cdot \frac{1\ \text{mol}}{18.02\ \text{g}} \cdot 40.67\ \text{kJ/mol}\right)$$

$$+(135\ \text{g} \cdot 1.84\ \text{J/g·°C} \cdot 20\text{°C})$$

$$= 4230\ \text{J} + 45.0\ \text{kJ} + 56,500\ \text{J} + 305\ \text{kJ} + 4970\ \text{J}$$

Converting the quantities in J to kJ permits them to be summed, yielding the total heat required:

$$= 4.23\ \text{kJ} + 45.0\ \text{kJ} + 56.5\ \text{kJ} + 305\ \text{kJ} + 4.97\ \text{kJ} = 416\ \text{kJ} onumber \tag{9.4.11}$$

Exercise 9.4.6

What is the total amount of heat released when 94.0 g water at 80.0 °C cools to form ice at −30.0 °C?

Answer

40.5 kJ

Summary

Phase transitions are processes that convert matter from one physical state into another. There are six phase transitions between the three phases of matter. Melting, vaporization, and sublimation are all endothermic processes, requiring an input of heat to overcome intermolecular attractions. The reciprocal transitions of freezing, condensation, and deposition are all exothermic processes, involving heat as intermolecular attractive forces are established or strengthened. The temperatures at which phase transitions occur are determined by the relative strengths of intermolecular attractions and are, therefore, dependent on the chemical identity of the substance.

Glossary

boiling point
temperature at which the vapor pressure of a liquid equals the pressure of the gas above it

condensation
change from a gaseous to a liquid state

deposition
change from a gaseous state directly to a solid state

freezing
change from a liquid state to a solid state

freezing point
temperature at which the solid and liquid phases of a substance are in equilibrium; see also *melting point*

melting
change from a solid state to a liquid state

melting point
temperature at which the solid and liquid phases of a substance are in equilibrium; see also *freezing point*

normal boiling point
temperature at which a liquid's vapor pressure equals 1 atm (760 torr)

sublimation

change from solid state directly to gaseous state

vapor pressure

(also, equilibrium vapor pressure) pressure exerted by a vapor in equilibrium with a solid or a liquid at a given temperature

vaporization

change from liquid state to gaseous state

Contributors

- Paul Flowers (University of North Carolina - Pembroke), Klaus Theopold (University of Delaware) and Richard Langley (Stephen F. Austin State University) with contributing authors. Textbook content produced by OpenStax College is licensed under a Creative Commons Attribution License 4.0 license. Download for free at http://cnx.org/contents/85abf193-2bd...a7ac8df6@9.110).

This page titled 9.4: Phase Transitions is shared under a CC BY license and was authored, remixed, and/or curated by OpenStax.

9.5: The Solid State of Matter

Learning Objectives

- Define and describe the bonding and properties of ionic, molecular, metallic, and covalent network crystalline solids
- Describe the main types of crystalline solids: ionic solids, metallic solids, covalent network solids, and molecular solids
- Explain the ways in which crystal defects can occur in a solid

When most liquids are cooled, they eventually freeze and form crystalline solids, solids in which the atoms, ions, or molecules are arranged in a definite repeating pattern. It is also possible for a liquid to freeze before its molecules become arranged in an orderly pattern. The resulting materials are called amorphous solids or noncrystalline solids (or, sometimes, glasses). The particles of such solids lack an ordered internal structure and are randomly arranged (Figure **9.5.1**).

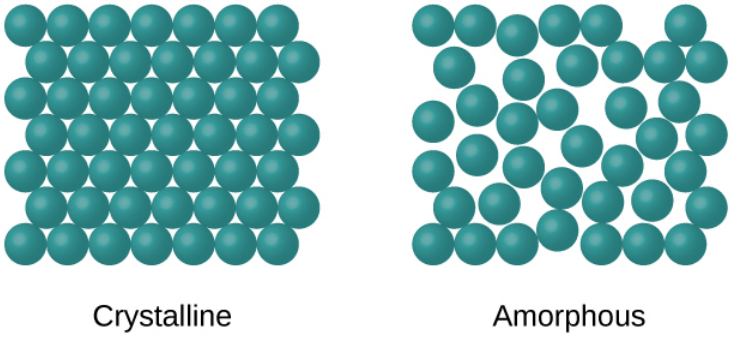

Figure **9.5.1**: The entities of a solid phase may be arranged in a regular, repeating pattern (crystalline solids) or randomly (amorphous).

Metals and ionic compounds typically form ordered, crystalline solids. Substances that consist of large molecules, or a mixture of molecules whose movements are more restricted, often form amorphous solids. For examples, candle waxes are amorphous solids composed of large hydrocarbon molecules. Some substances, such as boron oxide (Figure **9.5.2**), can form either crystalline or amorphous solids, depending on the conditions under which it is produced. Also, amorphous solids may undergo a transition to the crystalline state under appropriate conditions.

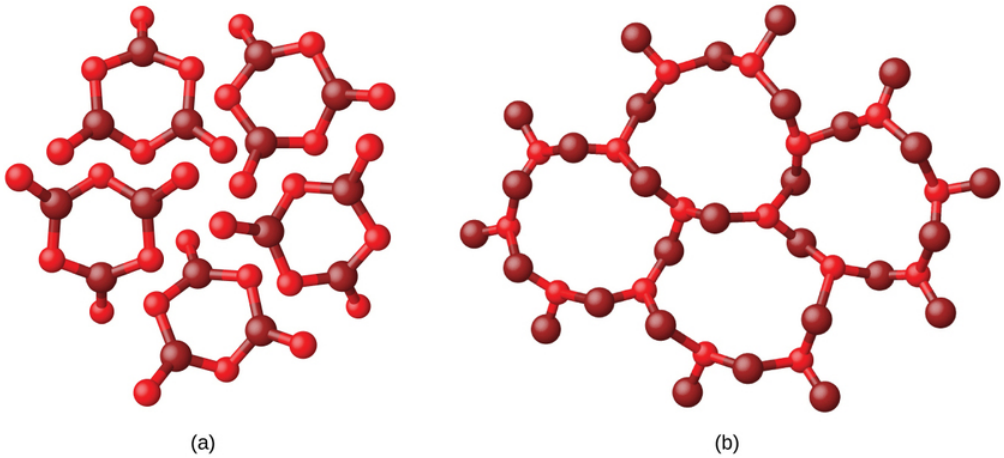

Figure **9.5.2**: (a) Diboron trioxide, B_2O_3, is normally found as a white, amorphous solid (a glass), which has a high degree of disorder in its structure. (b) By careful, extended heating, it can be converted into a crystalline form of B_2O_3, which has a very ordered arrangement.

Crystalline solids are generally classified according the nature of the forces that hold its particles together. These forces are primarily responsible for the physical properties exhibited by the bulk solids. The following sections provide descriptions of the major types of crystalline solids: ionic, metallic, covalent network, and molecular.

Ionic Solids

Ionic solids, such as sodium chloride and nickel oxide, are composed of positive and negative ions that are held together by electrostatic attractions, which can be quite strong (Figure **9.5.3**). Many ionic crystals also have high melting points. This is due to the very strong attractions between the ions—in ionic compounds, the attractions between full charges are (much) larger than those between the partial charges in polar molecular compounds. This will be looked at in more detail in a later discussion of lattice energies. Although they are hard, they also tend to be brittle, and they shatter rather than bend. Ionic solids do not conduct electricity; however, they do conduct when molten or dissolved because their ions are free to move. Many simple compounds formed by the reaction of a metallic element with a nonmetallic element are ionic.

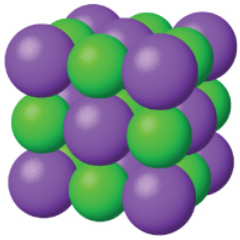

Figure **9.5.3**: Sodium chloride is an ionic solid.

Metallic Solids

Metallic solids such as crystals of copper, aluminum, and iron are formed by metal atoms Figure **9.5.4**. The structure of metallic crystals is often described as a uniform distribution of atomic nuclei within a “sea” of delocalized electrons. The atoms within such a metallic solid are held together by a unique force known as *metallic bonding* that gives rise to many useful and varied bulk properties. All exhibit high thermal and electrical conductivity, metallic luster, and malleability. Many are very hard and quite strong. Because of their malleability (the ability to deform under pressure or hammering), they do not shatter and, therefore, make useful construction materials. The melting points of the metals vary widely. Mercury is a liquid at room temperature, and the alkali metals melt below 200 °C. Several post-transition metals also have low melting points, whereas the transition metals melt at temperatures above 1000 °C. These differences reflect differences in strengths of metallic bonding among the metals.

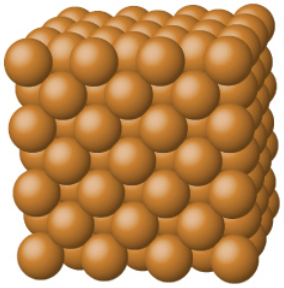

Figure **9.5.4**: Copper is a metallic solid.

Covalent Network Solids

Covalent network solids include crystals of diamond, silicon, some other nonmetals, and some covalent compounds such as silicon dioxide (sand) and silicon carbide (carborundum, the abrasive on sandpaper). Many minerals have networks of covalent bonds. The atoms in these solids are held together by a network of covalent bonds, as shown in Figure **9.5.5**. To break or to melt a covalent network solid, covalent bonds must be broken. Because covalent bonds are relatively strong, covalent network solids are typically characterized by hardness, strength, and high melting points. For example, diamond is one of the hardest substances known and melts above 3500 °C.

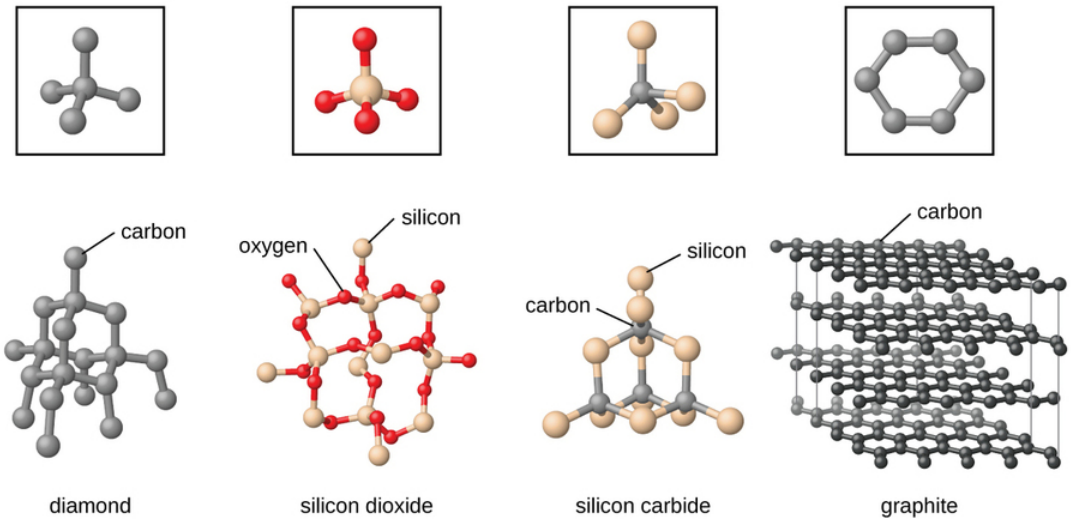

***Figure* 9.5.5**. *A covalent crystal contains a three-dimensional network of covalent bonds, as illustrated by the structures of diamond, silicon dioxide, silicon carbide, and graphite. Graphite is an exceptional example, composed of planar sheets of covalent crystals that are held together in layers by noncovalent forces. Unlike typical covalent solids, graphite is very soft and electrically conductive.*

Molecular Solids

Molecular solids, such as ice, sucrose (table sugar), and iodine, as shown in Figure **9.5.6**, are composed of neutral molecules. The strengths of the attractive forces between the units present in different crystals vary widely, as indicated by the melting points of the crystals. Small symmetrical molecules (nonpolar molecules), such as H_2, N_2, O_2, and F_2, have weak attractive forces and form molecular solids with very low melting points (below −200 °C). Substances consisting of larger, nonpolar molecules have larger attractive forces and melt at higher temperatures. Molecular solids composed of molecules with permanent dipole moments (polar molecules) melt at still higher temperatures. Examples include ice (melting point, 0 °C) and table sugar (melting point, 185 °C).

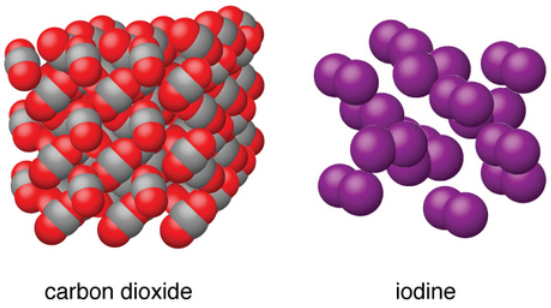

Figure **9.5.6**: Carbon dioxide (CO_2) consists of small, nonpolar molecules and forms a molecular solid with a melting point of −78 °C. Iodine (I_2) consists of larger, nonpolar molecules and forms a molecular solid that melts at 114 °C.

Properties of Solids

A crystalline solid, like those listed in Table **9.5.1** has a precise melting temperature because each atom or molecule of the same type is held in place with the same forces or energy. Thus, the attractions between the units that make up the crystal all have the same strength and all require the same amount of energy to be broken. The gradual softening of an amorphous material differs dramatically from the distinct melting of a crystalline solid. This results from the structural nonequivalence of the molecules in the amorphous solid. Some forces are weaker than others, and when an amorphous material is heated, the weakest intermolecular attractions break first. As the temperature is increased further, the stronger attractions are broken. Thus amorphous materials soften over a range of temperatures.

Table* 9.5.1*: *Types of Crystalline Solids and Their Properties*

Type of Solid	Type of Particles	Type of Attractions	Properties	Examples
ionic	ions	ionic bonds	hard, brittle, conducts electricity as a liquid but not as a solid, high to very high melting points	NaCl, Al_2O_3
metallic	atoms of electropositive elements	metallic bonds	shiny, malleable, ductile, conducts heat and electricity well, variable hardness and melting temperature	Cu, Fe, Ti, Pb, U
covalent network	atoms of electronegative elements	covalent bonds	very hard, not conductive, very high melting points	C (diamond), SiO_2, SiC
molecular	molecules (or atoms)	IMFs	variable hardness, variable brittleness, not conductive, low melting points	H_2O, CO_2, I_2, $C_{12}H_{22}O_{11}$

Graphene: Material of the Future

Carbon is an essential element in our world. The unique properties of carbon atoms allow the existence of carbon-based life forms such as ourselves. Carbon forms a huge variety of substances that we use on a daily basis, including those shown in Figure **9.5.7**. You may be familiar with diamond and graphite, the two most common *allotropes* of carbon. (Allotropes are different structural forms of the same element.) Diamond is one of the hardest-known substances, whereas graphite is soft enough to be used as pencil lead. These very different properties stem from the different arrangements of the carbon atoms in the different allotropes.

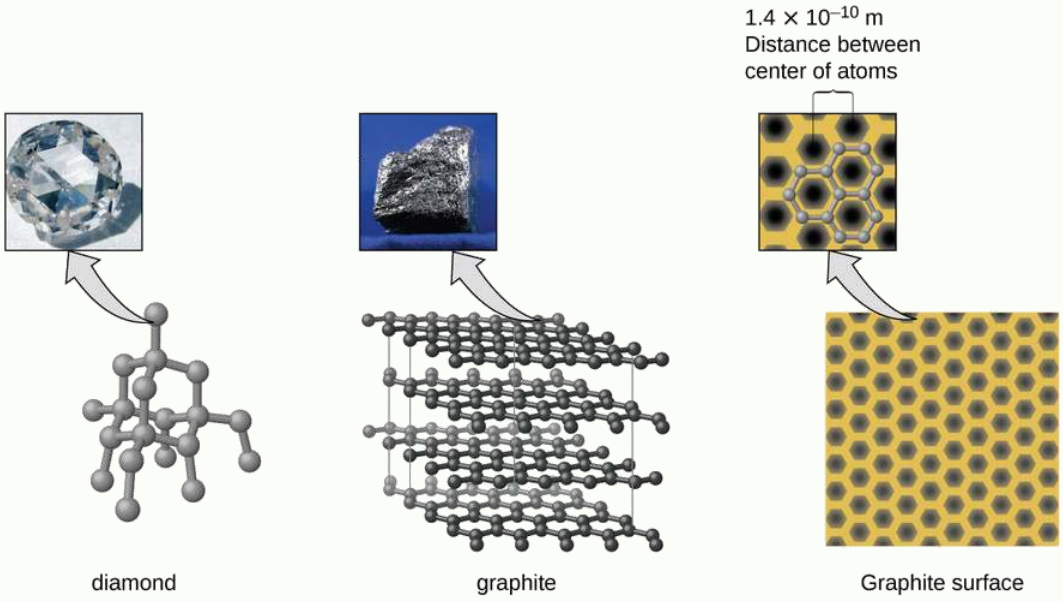

***Figure* 9.5.7:** *Diamond is extremely hard because of the strong bonding between carbon atoms in all directions. Graphite (in pencil lead) rubs off onto paper due to the weak attractions between the carbon layers. An image of a graphite surface shows the distance between the centers of adjacent carbon atoms. (credit left photo: modification of work by Steve Jurvetson; credit middle photo: modification of work by United States Geological Survey)*

You may be less familiar with a recently discovered form of carbon: graphene. Graphene was first isolated in 2004 by using tape to peel off thinner and thinner layers from graphite. It is essentially a single sheet (one atom thick) of graphite. Graphene, illustrated in Figure 9.5.8, is not only strong and lightweight, but it is also an excellent conductor of electricity and heat. These properties may prove very useful in a wide range of applications, such as vastly improved computer chips and circuits, better batteries and solar cells, and stronger and lighter structural materials. The 2010 Nobel Prize in Physics was awarded to Andre Geim and Konstantin Novoselov for their pioneering work with graphene.

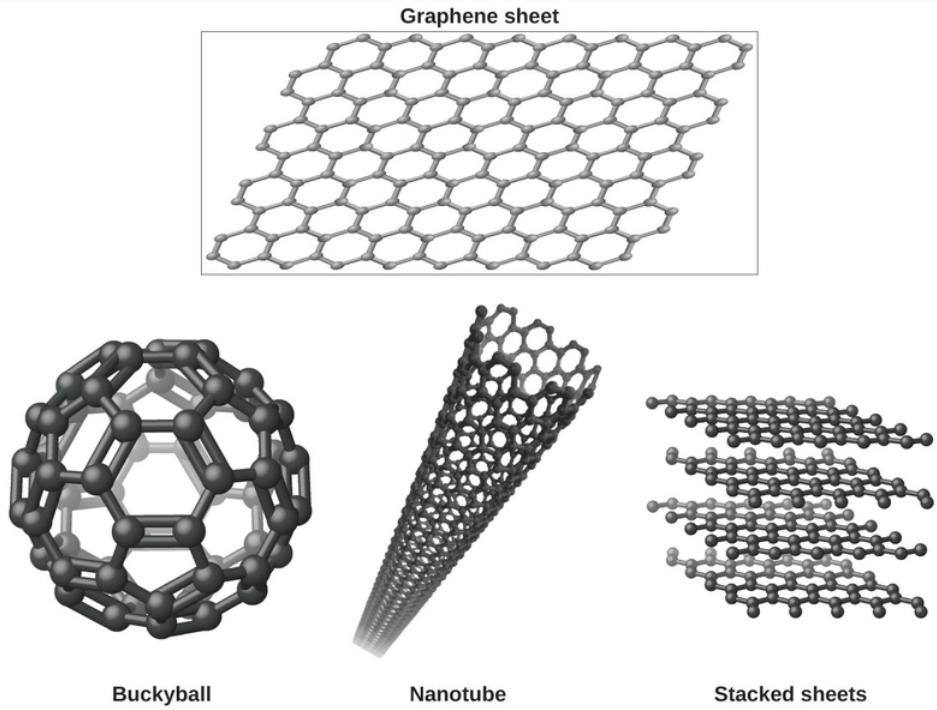

Figure 9.5.8: *Graphene sheets can be formed into buckyballs, nanotubes, and stacked layers.*

Summary

Some substances form crystalline solids consisting of particles in a very organized structure; others form amorphous (noncrystalline) solids with an internal structure that is not ordered. The main types of crystalline solids are ionic solids, metallic solids, covalent network solids, and molecular solids. The properties of the different kinds of crystalline solids are due to the types of particles of which they consist, the arrangements of the particles, and the strengths of the attractions between them. Because their particles experience identical attractions, crystalline solids have distinct melting temperatures; the particles in amorphous solids experience a range of interactions, so they soften gradually and melt over a range of temperatures. Some crystalline solids have defects in the definite repeating pattern of their particles. These defects (which include vacancies, atoms or ions not in the regular positions, and impurities) change physical properties such as electrical conductivity, which is exploited in the silicon crystals used to manufacture computer chips.

Glossary

amorphous solid

(also, noncrystalline solid) solid in which the particles lack an ordered internal structure

covalent network solid

solid whose particles are held together by covalent bonds

crystalline solid

solid in which the particles are arranged in a definite repeating pattern

Ionic solid

solid composed of positive and negative ions held together by strong electrostatic attractions

metallic solid

solid composed of metal atoms

molecular solid

solid composed of neutral molecules held together by intermolecular forces of attraction

Contributors

- Paul Flowers (University of North Carolina - Pembroke), Klaus Theopold (University of Delaware) and Richard Langley (Stephen F. Austin State University) with contributing authors. Textbook content produced by OpenStax College is licensed under a Creative Commons Attribution License 4.0 license. Download for free at http://cnx.org/contents/85abf193-2bd...a7ac8df6@9.110).

This page titled 9.5: The Solid State of Matter is shared under a CC BY license and was authored, remixed, and/or curated by OpenStax.

CHAPTER OVERVIEW

10: Solutions

A general chemistry Libretexts Textmap organized around the textbook
General Chemistry -Atoms First
By OpenStax

I II III IV V VI VII VIII IX X XI XII XIII XIV XV XVI XVII XVIII XIX XX XXI ● **Homework**

In this chapter, we will consider the nature of solutions, and examine factors that determine whether a solution will form and what properties it may have. In addition, we will discuss colloids—systems that resemble solutions but consist of dispersions of particles somewhat larger than ordinary molecules or ions.

Topic hierarchy

10.1: The Dissolution Process
10.2: Electrolytes
10.3: Solubility
10.4: Colligative Properties
10.5: Colloids

Contributors

- Paul Flowers (University of North Carolina - Pembroke), Klaus Theopold (University of Delaware) and Richard Langley (Stephen F. Austin State University) with contributing authors. Textbook content produced by OpenStax College is licensed under a Creative Commons Attribution License 4.0 license. Download for free at http://cnx.org/contents/85abf193-2bd...a7ac8df6@9.110).

This page titled 10: Solutions is shared under a CC BY license and was authored, remixed, and/or curated by OpenStax.

10.1: The Dissolution Process

Learning Objectives

- Describe the basic properties of solutions and how they form.
- Predict whether a given mixture will yield a solution based on molecular properties of its components.
- Explain why some solutions either produce or absorb heat when they form.

An earlier chapter of this text introduced *solutions*, defined as homogeneous mixtures of two or more substances. Often, one component of a solution is present at a significantly greater concentration, in which case it is called the solvent. The other components of the solution present in relatively lesser concentrations are called solutes. Sugar is a covalent solid composed of sucrose molecules, $\mathrm{C_{12}H_{22}O_{11}}$. When this compound dissolves in water, its molecules become uniformly distributed among the molecules of water:

$$\mathrm{C_{12}H_{22}O_{11}\,(s) \longrightarrow C_{12}H_{22}O_{11}\,(aq)} \tag{10.1.1}$$

The subscript "aq" in the equation signifies that the sucrose molecules are solutes and are therefore *individually dispersed* throughout the *aqueous solution* (water is the solvent). Although sucrose molecules are heavier than water molecules, they remain dispersed throughout the solution; gravity does not cause them to "settle out" over time.

Potassium dichromate, $\mathrm{K_2Cr_2O_7}$, is an ionic compound composed of colorless potassium ions, $\mathrm{K^+}$, and orange dichromate ions, $\mathrm{Cr_2O_7^{2-}}$. When a small amount of solid potassium dichromate is added to water, the compound dissolves and dissociates to yield potassium ions and dichromate ions uniformly distributed throughout the mixture (Figure 10.1.1), as indicated in this equation:

$$\mathrm{K_2Cr_2O_7\,(s) \longrightarrow 2\,K^+\,(aq) + Cr_2O_7^{2-}\,(aq)} \tag{10.1.2}$$

As with the mixture of sugar and water, this mixture is also an aqueous solution. Its solutes, potassium and dichromate ions, remain individually dispersed among the solvent (water) molecules.

Figure 10.1.1: When potassium dichromate ($\mathrm{K_2Cr_2O_7}$) is mixed with water, it forms a homogeneous orange solution. (credit: modification of work by Mark Ott).

The first photo shows a small mound of an orange crystalline solid. There is a right-facing arrow. The second photo shows a translucent, colorless liquid in a clear container. There is a right-facing arrow. The third photo shows a translucent orange liquid in a clear, covered container.

Water is used so often as a solvent that the word solution has come to imply an aqueous solution to many people. However, almost any gas, liquid, or solid can act as a solvent. Many alloys are solid solutions of one metal dissolved in another; for example, US five-cent coins contain nickel dissolved in copper. Air is a gaseous solution, a homogeneous mixture of nitrogen, oxygen, and several other gases. Oxygen (a gas), alcohol (a liquid), and sugar (a solid) all dissolve in water (a liquid) to form liquid solutions. Table 10.1.1 gives examples of several different solutions and the phases of the solutes and solvents.

Table 10.1.1: Different Types of Solutions

Solution	Solute	Solvent
air	$O_2(g)$	$N_2(g)$
soft drinks	$CO_2(g)$	$H_2O(l)$
hydrogen in palladium	$H_2(g)$	$Pd(s)$
rubbing alcohol	$H_2O(l)$	$C_3H_8O(l)$ (2-propanol)
saltwater	$NaCl(s)$	$H_2O(l)$
brass	$Zn(s)$	$Cu(s)$

Solutions exhibit these defining traits:

- They are homogeneous; that is, after a solution is mixed, it has the same composition at all points throughout (its composition is uniform).
- The physical state of a solution—solid, liquid, or gas—is typically the same as that of the solvent, as demonstrated by the examples in Table **10.1.1**.
- The components of a solution are dispersed on a molecular scale; that is, they consist of a mixture of separated molecules, atoms, and/or ions.
- The dissolved solute in a solution will not settle out or separate from the solvent.
- The composition of a solution, or the concentrations of its components, can be varied continuously, within limits.

The Formation of Solutions

The formation of a solution is an example of a spontaneous process, a process that occurs under specified conditions without the requirement of energy from some external source. Sometimes we stir a mixture to speed up the dissolution process, but this is not necessary; a homogeneous solution would form if we waited long enough. The topic of spontaneity is critically important to the study of chemical thermodynamics and is treated more thoroughly in a later chapter of this text. For purposes of this chapter's discussion, it will suffice to consider two criteria that *favor*, but do not guarantee, the spontaneous formation of a solution:

1. a decrease in the internal energy of the system (an exothermic change, as discussed in the previous chapter on thermochemistry)
2. an increase in the disorder in the system (which indicates an increase in the *entropy* of the system, as you will learn about in the later chapter on thermodynamics)

In the process of dissolution, an internal energy change often, but not always, occurs as heat is absorbed or evolved. An increase in disorder always results when a solution forms.

When the strengths of the intermolecular forces of attraction between solute and solvent species in a solution are no different than those present in the separated components, the solution is formed with no accompanying energy change. Such a solution is called an ideal solution. A mixture of ideal gases (or gases such as helium and argon, which closely approach ideal behavior) is an example of an ideal solution, since the entities comprising these gases experience no significant intermolecular attractions.

When containers of helium and argon are connected, the gases spontaneously mix due to diffusion and form a solution (Figure **10.1.2**). The formation of this solution clearly involves an increase in disorder, since the helium and argon atoms occupy a volume twice as large as that which each occupied before mixing.

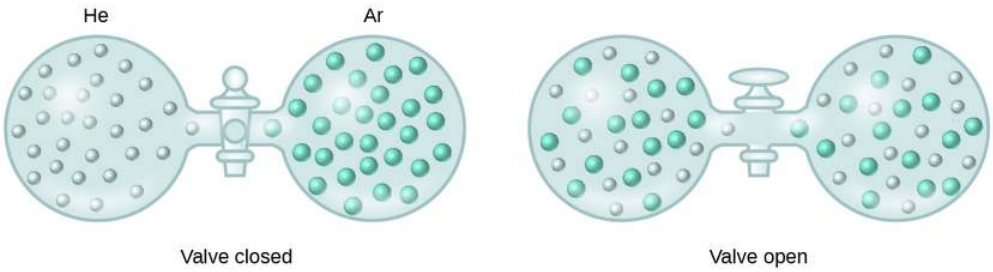

Figure **10.1.2**: Samples of helium and argon spontaneously mix to give a solution in which the disorder of the atoms of the two gases is increased.

Two figures are shown. The first contains two spherical containers joined by a closed stopcock. The container to the left is labeled H e. It holds about thirty evenly dispersed, small, light blue spheres. The container on the right is labeled A r and contains about thirty slightly larger blue-green spheres. The second, similar figure has an open stopcock between the two spherical containers. The light blue and green spheres are evenly dispersed and present in both containers.

Ideal solutions may also form when structurally similar liquids are mixed. For example, mixtures of the alcohols methanol (CH_3OH) and ethanol (C_2H_5OH) form ideal solutions, as do mixtures of the hydrocarbons pentane, $\mathbf{C_5H_{12}}$, and hexane, $\mathbf{C_6H_{14}}$. Placing methanol and ethanol, or pentane and hexane, in the bulbs shown in Figure **10.1.2** will result in the same diffusion and subsequent mixing of these liquids as is observed for the He and Ar gases (although at a much slower rate), yielding solutions with no significant change in energy. Unlike a mixture of gases, however, the components of these liquid-liquid solutions do, indeed, experience intermolecular attractive forces. But since the molecules of the two substances being mixed are structurally very similar, the intermolecular attractive forces between like and unlike molecules are essentially the same, and the dissolution process, therefore, does not entail any appreciable increase or decrease in energy. These examples illustrate how diffusion alone can provide the driving force required to cause the spontaneous formation of a solution. In some cases, however, the relative magnitudes of intermolecular forces of attraction between solute and solvent species may prevent dissolution.

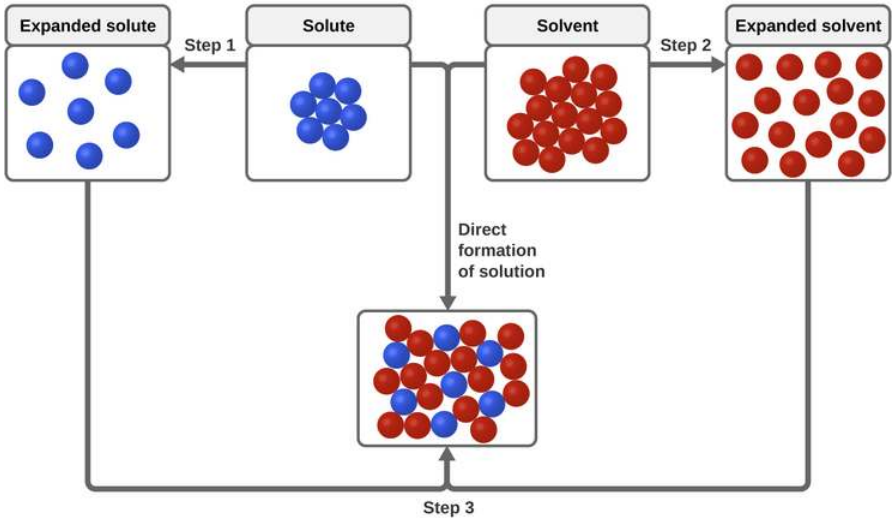

Figure **10.1.3**: This schematic representation of dissolution shows a stepwise process involving the endothermic separation of solute and solvent species (Steps 1 and 2) and exothermic solvation (Step 3).

The top, central region of the figure shows solute particles as seven blue spheres and solvent particles as 16 red spheres in separate, labeled boxes. The particles in these boxes are touching. An arrow labeled “Step 1” points left of the solute box, and shows the blue spheres no longer touching in another box labeled “expanded solute.” An arrow labeled “Step 2” points right from the solvent box and shows the red spheres no longer touching in another box labeled “expanded solvent.” Arrows proceed from the bottom of the expanded solute and expanded solvent boxes and join at the bottom of the figure where a step 3 label is shown. The joined arrows point to a box just above in which the red and blue spheres are mixed together and touching. The solute and solvent boxes are joined by another arrow labeled “direct formation of solution” which points downward at the center of the figure. This arrow also points to the box containing mixed red and blue spheres near the bottom of the figure.

Three types of intermolecular attractive forces are relevant to the dissolution process: solute-solute, solvent-solvent, and solute-solvent. As illustrated in Figure **10.1.3**, the formation of a solution may be viewed as a stepwise process in which energy is consumed to overcome solute-solute and solvent-solvent attractions (endothermic processes) and released when solute-solvent attractions are established (an exothermic process referred to as solvation). The relative magnitudes of the energy changes

associated with these stepwise processes determine whether the dissolution process overall will release or absorb energy. In some cases, solutions do not form because the energy required to separate solute and solvent species is so much greater than the energy released by solvation.

Figure **10.1.4**: A mixture of nonpolar cooking oil and polar water does not yield a solution. (credit: Gautam Dogra).

For example, cooking oils and water will not mix to any appreciable extent to yield solutions (Figure **10.1.4**). Hydrogen bonding is the dominant intermolecular attractive force present in liquid water; the nonpolar hydrocarbon molecules of cooking oils are not capable of hydrogen bonding, instead being held together by dispersion forces. Forming an oil-water solution would require overcoming the very strong hydrogen bonding in water, as well as the significantly strong dispersion forces between the relatively large oil molecules. And, since the polar water molecules and nonpolar oil molecules would not experience very strong intermolecular attraction, very little energy would be released by solvation.

On the other hand, a mixture of ethanol and water will mix in any proportions to yield a solution. In this case, both substances are capable of hydrogen bonding, and so the solvation process is sufficiently exothermic to compensate for the endothermic separations of solute and solvent molecules.

Figure **10.1.5**: An instant cold pack gets cold when certain salts, such as ammonium nitrate, dissolve in water—an endothermic process.

This figure shows a single use instant cold pack with labels indicating an inner bag of water surrounded by white particulate ammonium nitrate.

As noted at the beginning of this module, spontaneous solution formation is favored, but not guaranteed, by exothermic dissolution processes. While many soluble compounds do, indeed, dissolve with the release of heat, some dissolve endothermically. Ammonium nitrate (NH_4NO_3) is one such example and is used to make instant cold packs for treating injuries like the one pictured in Figure **10.1.5**. A thin-walled plastic bag of water is sealed inside a larger bag with solid NH_4NO_3. When the smaller bag is broken, a solution of NH_4NO_3 forms, absorbing heat from the surroundings (the injured area to which the pack is applied) and providing a cold compress that decreases swelling. Endothermic dissolutions such as this one require a greater energy input to

separate the solute species than is recovered when the solutes are solvated, but they are spontaneous nonetheless due to the increase in disorder that accompanies formation of the solution.

Video 10.1.1*: Watch this brief video illustrating endothermic and exothermic dissolution processes.*

Summary

A solution forms when two or more substances combine physically to yield a mixture that is homogeneous at the molecular level. The solvent is the most concentrated component and determines the physical state of the solution. The solutes are the other components typically present at concentrations less than that of the solvent. Solutions may form endothermically or exothermically, depending upon the relative magnitudes of solute and solvent intermolecular attractive forces. Ideal solutions form with no appreciable change in energy.

Footnotes

1. If bubbles of gas are observed within the liquid, the mixture is not homogeneous and, thus, not a solution.

Glossary

alloy
: solid mixture of a metallic element and one or more additional elements

ideal solution
: solution that forms with no accompanying energy change

solvation
: exothermic process in which intermolecular attractive forces between the solute and solvent in a solution are established

spontaneous process
: physical or chemical change that occurs without the addition of energy from an external source

---

This page titled 10.1: The Dissolution Process is shared under a CC BY license and was authored, remixed, and/or curated by OpenStax.

- **11.2: The Dissolution Process** by OpenStax is licensed CC BY 4.0. Original source: https://openstax.org/details/books/chemistry-2e.

10.2: Electrolytes

Learning Objectives

- Define and give examples of electrolytes
- Distinguish between the physical and chemical changes that accompany dissolution of ionic and covalent electrolytes
- Relate electrolyte strength to solute-solvent attractive forces

When some substances are dissolved in water, they undergo either a physical or a chemical change that yields ions in solution. These substances constitute an important class of compounds called electrolytes. Substances that do not yield ions when dissolved are called nonelectrolytes. If the physical or chemical process that generates the ions is essentially 100% efficient (all of the dissolved compound yields ions), then the substance is known as a strong electrolyte. If only a relatively small fraction of the dissolved substance undergoes the ion-producing process, it is called a weak electrolyte.

Substances may be identified as strong, weak, or nonelectrolytes by measuring the electrical conductance of an aqueous solution containing the substance. To conduct electricity, a substance must contain freely mobile, charged species. Most familiar is the conduction of electricity through metallic wires, in which case the mobile, charged entities are electrons. Solutions may also conduct electricity if they contain dissolved ions, with conductivity increasing as ion concentration increases. Applying a voltage to electrodes immersed in a solution permits assessment of the relative concentration of dissolved ions, either quantitatively, by measuring the electrical current flow, or qualitatively, by observing the brightness of a light bulb included in the circuit (Figure **10.2.1**).

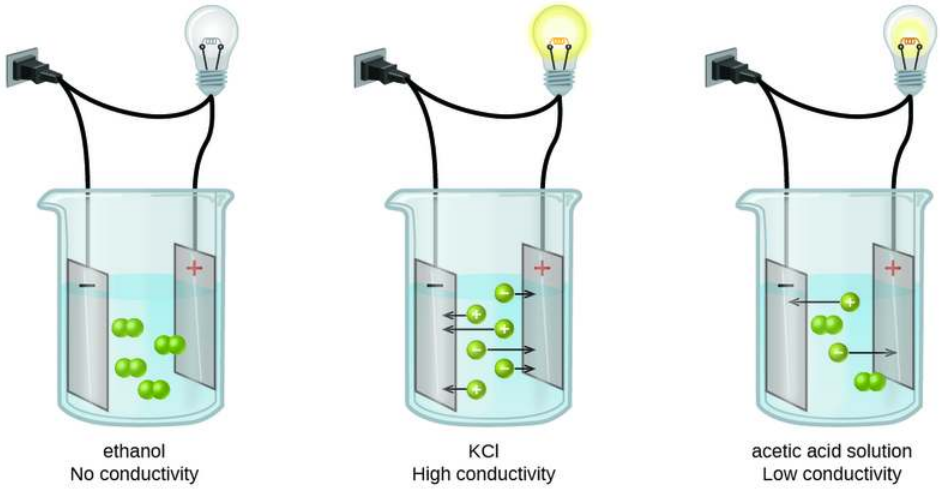

Figure **10.2.1**: Solutions of nonelectrolytes such as ethanol do not contain dissolved ions and cannot conduct electricity. Solutions of electrolytes contain ions that permit the passage of electricity. The conductivity of an electrolyte solution is related to the strength of the electrolyte.

This diagram shows three separate beakers. Each has a wire plugged into a wall outlet. In each case, the wire leads from the wall to the beaker and is split resulting in two ends. One end leads to a light bulb and continues on to a rectangle labeled with a plus sign. The other end leads to a rectangle labeled with a minus sign. The rectangles are in a solution. In the first beaker, labeled “Ethanol No Conductivity,” four pairs of linked small green spheres suspended in the solution between the rectangles. In the second beaker, labeled “K C l Strong Conductivity,” six individual green spheres, three labeled plus and three labeled minus are suspended in the solution. Each of the six spheres has an arrow extending from it pointing to the rectangle labeled with the opposite sign. In the third beaker, labeled “Acetic acid solution Weak conductivity,” two pairs of joined green spheres and two individual spheres, one labeled plus and one labeled minus are shown suspended between the two rectangles. The plus labeled sphere has an arrow pointing to the rectangle labeled minus and the minus labeled sphere has an arrow pointing to the rectangle labeled plus.

Ionic Electrolytes

Water and other polar molecules are attracted to ions, as shown in Figure **10.2.2**. The electrostatic attraction between an ion and a molecule with a dipole is called an ion-dipole attraction. These attractions play an important role in the dissolution of ionic compounds in water.

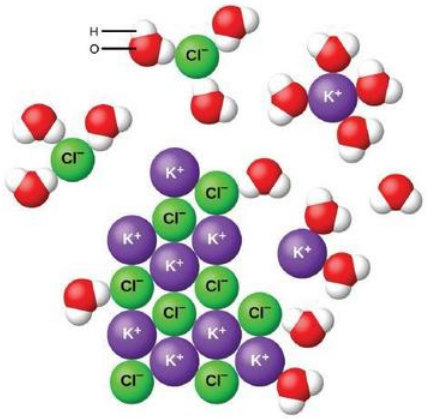

Figure 10.2.2: As potassium chloride (KCl) dissolves in water, the ions are hydrated. The polar water molecules are attracted by the charges on the K^+ and Cl^- ions. Water molecules in front of and behind the ions are not shown.

The diagram shows eight purple spheres labeled K superscript plus and eight green spheres labeled C l superscript minus mixed and touching near the center of the diagram. Outside of this cluster of spheres are seventeen clusters of three spheres, which include one red and two white spheres. A red sphere in one of these clusters is labeled O. A white sphere is labeled H. Two of the green C l superscript minus spheres are surrounded by three of the red and white clusters, with the red spheres closer to the green spheres than the white spheres. One of the K superscript plus purple spheres is surrounded by four of the red and white clusters. The white spheres of these clusters are closest to the purple spheres.

When ionic compounds dissolve in water, the ions in the solid separate and disperse uniformly throughout the solution because water molecules surround and solvate the ions, reducing the strong electrostatic forces between them. This process represents a physical change known as dissociation. Under most conditions, ionic compounds will dissociate nearly completely when dissolved, and so they are classified as strong electrolytes.

Let us consider what happens at the microscopic level when we add solid KCl to water. Ion-dipole forces attract the positive (hydrogen) end of the polar water molecules to the negative chloride ions at the surface of the solid, and they attract the negative (oxygen) ends to the positive potassium ions. The water molecules penetrate between individual K^+ and Cl^- ions and surround them, reducing the strong interionic forces that bind the ions together and letting them move off into solution as solvated ions, as Figure shows. The reduction of the electrostatic attraction permits the independent motion of each hydrated ion in a dilute solution, resulting in an increase in the disorder of the system as the ions change from their fixed and ordered positions in the crystal to mobile and much more disordered states in solution. This increased disorder is responsible for the dissolution of many ionic compounds, including KCl, which dissolve with absorption of heat.

In other cases, the electrostatic attractions between the ions in a crystal are so large, or the ion-dipole attractive forces between the ions and water molecules are so weak, that the increase in disorder cannot compensate for the energy required to separate the ions, and the crystal is insoluble. Such is the case for compounds such as calcium carbonate (limestone), calcium phosphate (the inorganic component of bone), and iron oxide (rust).

Covalent Electrolytes

Pure water is an extremely poor conductor of electricity because it is only very slightly ionized—only about two out of every 1 billion molecules ionize at 25 °C. Water ionizes when one molecule of water gives up a proton to another molecule of water, yielding hydronium and hydroxide ions.

$$\mathrm{H_2O\,(l) + H_2O\,(l) \rightleftharpoons H_3O^+\,(aq) + OH^-\,(aq)} \tag{10.2.1}$$

In some cases, we find that solutions prepared from covalent compounds conduct electricity because the solute molecules react chemically with the solvent to produce ions. For example, pure hydrogen chloride is a gas consisting of covalent HCl molecules. This gas contains no ions. However, when we dissolve hydrogen chloride in water, we find that the solution is a very good conductor. The water molecules play an essential part in forming ions: Solutions of hydrogen chloride in many other solvents, such as benzene, do not conduct electricity and do not contain ions.

Hydrogen chloride is an *acid*, and so its molecules react with water, transferring H^+ ions to form hydronium ions (H_3O^+) and chloride ions (Cl^-):

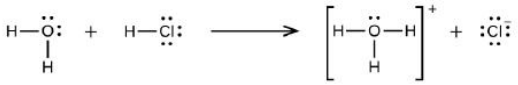

A chemical equation is shown. To the left, two hydrogen atoms are linked, each with a single dash to a central oxygen atom to the left and below the oxygen symbol, which has two pairs of dots, above and to the right of the atom. A plus sign is shown to the right, then a hydrogen atom linked to the left side of chlorine atom by a single dash with three pairs of dots, above, to the right, and below the element symbol. An arrow points to the products which are three hydrogen atoms linked by single dashes to a central oxygen atom shown in brackets with superscript plus. The oxygen atom has a single pair of dots above the element symbol. This is followed by a plus and C l superscript minus. This symbol is surrounded by four pairs of dots, above and below and to the left and right of the element symbol.

This reaction is essentially 100% complete for HCl (i.e., it is a *strong acid* and, consequently, a strong electrolyte). Likewise, weak acids and bases that only react partially generate relatively low concentrations of ions when dissolved in water and are classified as weak electrolytes. The reader may wish to review the discussion of strong and weak acids provided in the earlier chapter of this text on reaction classes and stoichiometry.

Summary

Substances that dissolve in water to yield ions are called electrolytes. Electrolytes may be covalent compounds that chemically react with water to produce ions (for example, acids and bases), or they may be ionic compounds that dissociate to yield their constituent cations and anions, when dissolved. Dissolution of an ionic compound is facilitated by ion-dipole attractions between the ions of the compound and the polar water molecules. Soluble ionic substances and strong acids ionize completely and are strong electrolytes, while weak acids and bases ionize to only a small extent and are weak electrolytes. Nonelectrolytes are substances that do not produce ions when dissolved in water.

Glossary

dissociation
: physical process accompanying the dissolution of an ionic compound in which the compound’s constituent ions are solvated and dispersed throughout the solution

electrolyte
: substance that produces ions when dissolved in water

ion-dipole attraction
: electrostatic attraction between an ion and a polar molecule

nonelectrolyte
: substance that does not produce ions when dissolved in water

strong electrolyte
: substance that dissociates or ionizes completely when dissolved in water

weak electrolyte
: substance that ionizes only partially when dissolved in water

---

This page titled 10.2: Electrolytes is shared under a CC BY license and was authored, remixed, and/or curated by OpenStax.

- **11.3: Electrolytes** by OpenStax is licensed CC BY 4.0. Original source: https://openstax.org/details/books/chemistry-2e.

10.3: Solubility

Learning Objectives

- Describe the effects of temperature and pressure on solubility
- State Henry's law and use it in calculations involving the solubility of a gas in a liquid
- Explain the degrees of solubility possible for liquid-liquid solutions

Imagine adding a small amount of salt to a glass of water, stirring until all the salt has dissolved, and then adding a bit more. You can repeat this process until the salt concentration of the solution reaches its natural limit, a limit determined primarily by the relative strengths of the solute-solute, solute-solvent, and solvent-solvent attractive forces discussed in the previous two modules of this chapter. You can be certain that you have reached this limit because, no matter how long you stir the solution, undissolved salt remains. The concentration of salt in the solution at this point is known as its solubility.

The solubility of a solute in a particular solvent is the maximum concentration that may be achieved under given conditions when the dissolution process is *at equilibrium*. Referring to the example of salt in water:

$$\mathrm{NaCl}(s) \rightleftharpoons \mathrm{Na}^+(aq) + \mathrm{Cl}^-(aq) \tag{10.3.1}$$

When a solute's concentration is equal to its solubility, the solution is said to be saturated with that solute. If the solute's concentration is less than its solubility, the solution is said to be unsaturated. A solution that contains a relatively low concentration of solute is called dilute, and one with a relatively high concentration is called concentrated.

If we add more salt to a saturated solution of salt, we see it fall to the bottom and no more seems to dissolve. In fact, the added salt does dissolve, as represented by the forward direction of the dissolution equation. Accompanying this process, dissolved salt will precipitate, as depicted by the reverse direction of the equation. The system is said to be at equilibrium when these two reciprocal processes are occurring at equal rates, and so the amount of undissolved and dissolved salt remains constant. Support for the simultaneous occurrence of the dissolution and precipitation processes is provided by noting that the number and sizes of the undissolved salt crystals will change over time, though their combined mass will remain the same.

Video* 10.3.1*: *Watch this impressive video showing the precipitation of sodium acetate from a supersaturated solution.*

Solutions may be prepared in which a solute concentration *exceeds* its solubility. Such solutions are said to be supersaturated, and they are interesting examples of *nonequilibrium* states. For example, the carbonated beverage in an open container that has not yet "gone flat" is supersaturated with carbon dioxide gas; given time, the CO_2 concentration will decrease until it reaches its equilibrium value.

Solutions of Gases in Liquids

In an earlier module of this chapter, the effect of intermolecular attractive forces on solution formation was discussed. The chemical structures of the solute and solvent dictate the types of forces possible and, consequently, are important factors in determining solubility. For example, under similar conditions, the water solubility of oxygen is approximately three times greater than that of

helium, but 100 times less than the solubility of chloromethane, $CHCl_3$. Considering the role of the solvent's chemical structure, note that the solubility of oxygen in the liquid hydrocarbon hexane, C_6H_{14}, is approximately 20 times greater than it is in water.

Other factors also affect the solubility of a given substance in a given solvent. Temperature is one such factor, with gas solubility typically decreasing as temperature increases (Figure **10.3.1**). This is one of the major impacts resulting from the thermal pollution of natural bodies of water.

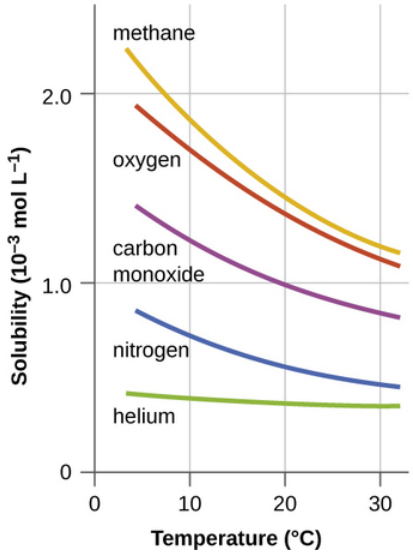

Figure **10.3.1**: The solubilities of these gases in water decrease as the temperature increases. All solubilities were measured with a constant pressure of 101.3 kPa (1 atm) of gas above the solutions.

When the temperature of a river, lake, or stream is raised abnormally high, usually due to the discharge of hot water from some industrial process, the solubility of oxygen in the water is decreased. Decreased levels of dissolved oxygen may have serious consequences for the health of the water's ecosystems and, in severe cases, can result in large-scale fish kills (Figure **10.3.2**).

(a) (b)

Figure **10.3.2**: (a) The small bubbles of air in this glass of chilled water formed when the water warmed to room temperature and the solubility of its dissolved air decreased. (b) The decreased solubility of oxygen in natural waters subjected to thermal pollution can result in large-scale fish kills. (credit a: modification of work by Liz West; credit b: modification of work by U.S. Fish and Wildlife Service)

The solubility of a gaseous solute is also affected by the partial pressure of solute in the gas to which the solution is exposed. Gas solubility increases as the pressure of the gas increases. Carbonated beverages provide a nice illustration of this relationship. The carbonation process involves exposing the beverage to a relatively high pressure of carbon dioxide gas and then sealing the beverage container, thus saturating the beverage with CO_2 at this pressure. When the beverage container is opened, a familiar hiss is heard as the carbon dioxide gas pressure is released, and some of the dissolved carbon dioxide is typically seen leaving solution in the form of small bubbles (Figure **10.3.3**). At this point, the beverage is *supersaturated* with carbon dioxide and, with time, the dissolved carbon dioxide concentration will decrease to its equilibrium value and the beverage will become "flat."



Figure 10.3.3: Opening the bottle of carbonated beverage reduces the pressure of the gaseous carbon dioxide above the beverage. The solubility of CO_2 is thus lowered, and some dissolved carbon dioxide may be seen leaving the solution as small gas bubbles. (credit: modification of work by Derrick Coetzee)

Gases can form supersaturated solutions. If a solution of a gas in a liquid is prepared either at low temperature or under pressure (or both), then as the solution warms or as the gas pressure is reduced, the solution may become supersaturated. In 1986, more than 1700 people in Cameroon were killed when a cloud of gas, almost certainly carbon dioxide, bubbled from Lake Nyos (Figure 10.3.5), a deep lake in a volcanic crater. The water at the bottom of Lake Nyos is saturated with carbon dioxide by volcanic activity beneath the lake. It is believed that the lake underwent a turnover due to gradual heating from below the lake, and the warmer, less-dense water saturated with carbon dioxide reached the surface. Consequently, tremendous quantities of dissolved CO_2 were released, and the colorless gas, which is denser than air, flowed down the valley below the lake and suffocated humans and animals living in the valley.

(a) (b)

Figure 10.3.5: (a) It is believed that the 1986 disaster that killed more than 1700 people near Lake Nyos in Cameroon resulted when a large volume of carbon dioxide gas was released from the lake. (b) A CO_2 vent has since been installed to help outgas the lake in a slow, controlled fashion and prevent a similar catastrophe from happening in the future. (credit a: modification of work by Jack Lockwood; credit b: modification of work by Bill Evans)

Solutions of Liquids in Liquids

We know that some liquids mix with each other in all proportions; in other words, they have infinite mutual solubility and are said to be miscible. Ethanol, sulfuric acid, and ethylene glycol (popular for use as antifreeze, pictured in Figure 10.3.6) are examples of liquids that are completely miscible with water. Two-cycle motor oil is miscible with gasoline.

Figure **10.3.6**: Water and antifreeze are miscible; mixtures of the two are homogeneous in all proportions. (credit: "dno1967"/Wikimedia commons)

Liquids that mix with water in all proportions are usually polar substances or substances that form hydrogen bonds. For such liquids, the dipole-dipole attractions (or hydrogen bonding) of the solute molecules with the solvent molecules are at least as strong as those between molecules in the pure solute or in the pure solvent. Hence, the two kinds of molecules mix easily. Likewise, nonpolar liquids are miscible with each other because there is no appreciable difference in the strengths of solute-solute, solvent-solvent, and solute-solvent intermolecular attractions. The solubility of polar molecules in polar solvents and of nonpolar molecules in nonpolar solvents is, again, an illustration of the chemical axiom "like dissolves like."

Two liquids that do not mix to an appreciable extent are called immiscible. Layers are formed when we pour immiscible liquids into the same container. Gasoline, oil (Figure **10.3.7**), benzene, carbon tetrachloride, some paints, and many other nonpolar liquids are immiscible with water. The attraction between the molecules of such nonpolar liquids and polar water molecules is ineffectively weak. The only strong attractions in such a mixture are between the water molecules, so they effectively squeeze out the molecules of the nonpolar liquid. The distinction between immiscibility and miscibility is really one of degrees, so that miscible liquids are of infinite mutual solubility, while liquids said to be immiscible are of very low (though not zero) mutual solubility.

Figure **10.3.7**: Water and oil are immiscible. Mixtures of these two substances will form two separate layers with the less dense oil floating on top of the water. (credit: "Yortw"/Flickr)

Two liquids, such as bromine and water, that are of *moderate* mutual solubility are said to be partially miscible. Two partially miscible liquids usually form two layers when mixed. In the case of the bromine and water mixture, the upper layer is water, saturated with bromine, and the lower layer is bromine saturated with water. Since bromine is nonpolar, and, thus, not very soluble in water, the water layer is only slightly discolored by the bright orange bromine dissolved in it. Since the solubility of water in bromine is very low, there is no noticeable effect on the dark color of the bromine layer (Figure **10.3.8**).

Figure 10.3.8: Bromine (the deep orange liquid on the left) and water (the clear liquid in the middle) are partially miscible. The top layer in the mixture on the right is a saturated solution of bromine in water; the bottom layer is a saturated solution of water in bromine. (credit: Paul Flowers)

Solutions of Solids in Liquids

The dependence of solubility on temperature for a number of inorganic solids in water is shown by the solubility curves in Figure 10.3.9. Reviewing these data indicate a general trend of increasing solubility with temperature, although there are exceptions, as illustrated by the ionic compound cerium sulfate.

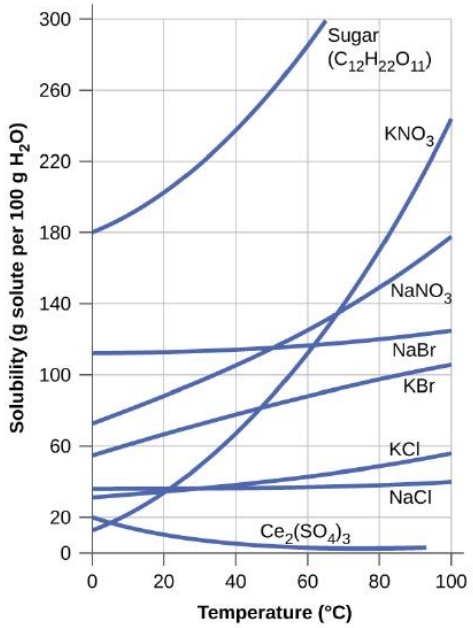

Figure 10.3.9: This graph shows how the solubility of several solids changes with temperature.

The temperature dependence of solubility can be exploited to prepare supersaturated solutions of certain compounds. A solution may be saturated with the compound at an elevated temperature (where the solute is more soluble) and subsequently cooled to a lower temperature without precipitating the solute. The resultant solution contains solute at a concentration greater than its equilibrium solubility at the lower temperature (i.e., it is supersaturated) and is relatively stable. Precipitation of the excess solute can be initiated by adding a seed crystal (see the video in the Link to Learning earlier in this module) or by mechanically agitating the solution. Some hand warmers, such as the one pictured in Figure 10.3.10, take advantage of this behavior.

Figure 10.3.10: This hand warmer produces heat when the sodium acetate in a supersaturated solution precipitates. Precipitation of the solute is initiated by a mechanical shockwave generated when the flexible metal disk within the solution is "clicked." (credit: modification of work by "Velela"/Wikimedia Commons)

***Video* 10.3.2:** *This video shows the crystallization process occurring in a hand warmer.*

Summary

The extent to which one substance will dissolve in another is determined by several factors, including the types and relative strengths of intermolecular attractive forces that may exist between the substances' atoms, ions, or molecules. This tendency to dissolve is quantified as substance's solubility, its maximum concentration in a solution at equilibrium under specified conditions. A saturated solution contains solute at a concentration equal to its solubility. A supersaturated solution is one in which a solute's concentration exceeds its solubility—a nonequilibrium (unstable) condition that will result in solute precipitation when the solution is appropriately perturbed. Miscible liquids are soluble in all proportions, and immiscible liquids exhibit very low mutual solubility. Solubilities for gaseous solutes decrease with increasing temperature, while those for most, but not all, solid solutes increase with temperature. The concentration of a gaseous solute in a solution is proportional to the partial pressure of the gas to which the solution is exposed, a relation known as Henry's law.

Key Equations

- $C_g = kP_g$

Glossary

immiscible
: of negligible mutual solubility; typically refers to liquid substances

miscible
: mutually soluble in all proportions; typically refers to liquid substances

partially miscible
: of moderate mutual solubility; typically refers to liquid substances

saturated
: of concentration equal to solubility; containing the maximum concentration of solute possible for a given temperature and pressure

solubility

extent to which a solute may be dissolved in water, or any solvent

supersaturated

of concentration that exceeds solubility; a nonequilibrium state

unsaturated

of concentration less than solubility

Contributors

- Paul Flowers (University of North Carolina - Pembroke), Klaus Theopold (University of Delaware) and Richard Langley (Stephen F. Austin State University) with contributing authors. Textbook content produced by OpenStax College is licensed under a Creative Commons Attribution License 4.0 license. Download for free at http://cnx.org/contents/85abf193-2bd...a7ac8df6@9.110).

This page titled 10.3: Solubility is shared under a CC BY license and was authored, remixed, and/or curated by OpenStax.

10.4: Colligative Properties

Learning Objectives

- Describe the effect of solute concentration on various solution properties (vapor pressure, boiling point, freezing point, and osmotic pressure)
- Describe the process of distillation and its practical applications
- Explain the process of osmosis and describe how it is applied industrially and in nature

The properties of a solution are different from those of either the pure solute(s) or solvent. Many solution properties are dependent upon the chemical identity of the solute. Compared to pure water, a solution of hydrogen chloride is more acidic, a solution of ammonia is more basic, a solution of sodium chloride is more dense, and a solution of sucrose is more viscous. There are a few solution properties, however, that depend *only* upon the total concentration of solute species, regardless of their identities. These colligative properties include vapor pressure lowering, boiling point elevation, freezing point depression, and osmotic pressure. This small set of properties is of central importance to many natural phenomena and technological applications, as will be described in this module.

Vapor Pressure Lowering

As described in the chapter on liquids and solids, the equilibrium vapor pressure of a liquid is the pressure exerted by its gaseous phase when vaporization and condensation are occurring at equal rates:

$$\text{liquid} \rightleftharpoons \text{gas} \tag{10.4.1}$$

Dissolving a nonvolatile substance in a volatile liquid results in a lowering of the liquid's vapor pressure. This phenomenon can be rationalized by considering the effect of added solute molecules on the liquid's vaporization and condensation processes. To vaporize, solvent molecules must be present at the surface of the solution. The presence of solute decreases the surface area available to solvent molecules and thereby reduces the rate of solvent vaporization. Since the rate of condensation is unaffected by the presence of solute, the net result is that the vaporization-condensation equilibrium is achieved with fewer solvent molecules in the vapor phase (i.e., at a lower vapor pressure) (Figure 10.4.1). While this kinetic interpretation is useful, it does not account for several important aspects of the colligative nature of vapor pressure lowering. A more rigorous explanation involves the property of *entropy*, a topic of discussion in a later text chapter on thermodynamics. For purposes of understanding the lowering of a liquid's vapor pressure, it is adequate to note that the greater entropy of a solution in comparison to its separate solvent and solute serves to effectively stabilize the solvent molecules and hinder their vaporization. A lower vapor pressure results, and a correspondingly higher boiling point as described in the next section of this module.

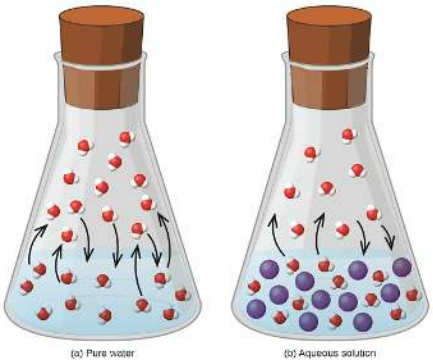

Figure 10.4.1: The presence of nonvolatile solutes lowers the vapor pressure of a solution by impeding the evaporation of solvent molecules.

Elevation of the Boiling Point of a Solvent

As described in the chapter on liquids and solids, the *boiling point* of a liquid is the temperature at which its vapor pressure is equal to ambient atmospheric pressure. Since the vapor pressure of a solution is lowered due to the presence of nonvolatile solutes, it

stands to reason that the solution's boiling point will subsequently be increased. Compared to pure solvent, a solution, therefore, will require a higher temperature to achieve any given vapor pressure, including one equivalent to that of the surrounding atmosphere. The extent to which the vapor pressure of a solvent is lowered and the boiling point is elevated depends on the total number of solute particles present in a given amount of solvent, not on the mass or size or chemical identities of the particles. A 1 *m* aqueous solution of sucrose (342 g/mol) and a 1 *m* aqueous solution of ethylene glycol (62 g/mol) will exhibit the same boiling point because each solution has one mole of solute particles (molecules) per kilogram of solvent.

Distillation of Solutions

Distillation is a technique for separating the components of mixtures that is widely applied in both in the laboratory and in industrial settings. It is used to refine petroleum, to isolate fermentation products, and to purify water. This separation technique involves the controlled heating of a sample mixture to selectively vaporize, condense, and collect one or more components of interest. A typical apparatus for laboratory-scale distillations is shown in Figure **10.4.2**.

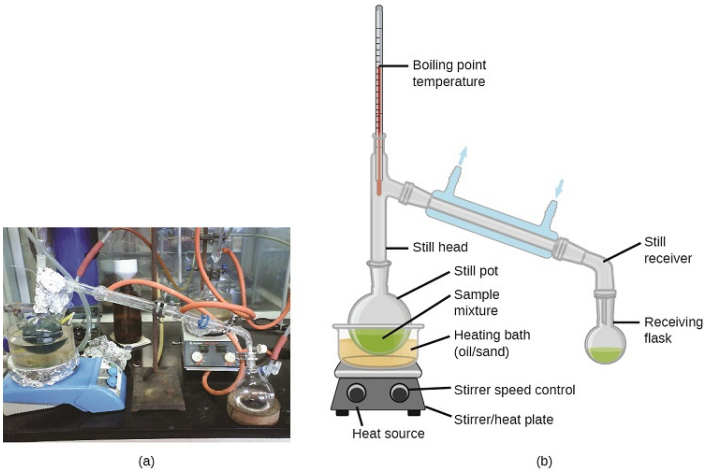

Figure **10.4.2**: A typical laboratory distillation unit is shown in (a) a photograph and (b) a schematic diagram of the components. (credit a: modification of work by "Rifleman82"/Wikimedia commons; credit b: modification of work by "Slashme"/Wikimedia Commons)

Oil refineries use large-scale *fractional distillation* to separate the components of crude oil. The crude oil is heated to high temperatures at the base of a tall *fractionating column*, vaporizing many of the components that rise within the column. As vaporized components reach adequately cool zones during their ascent, they condense and are collected. The collected liquids are simpler mixtures of hydrocarbons and other petroleum compounds that are of appropriate composition for various applications (e.g., diesel fuel, kerosene, gasoline), as depicted in Figure **10.4.3**.

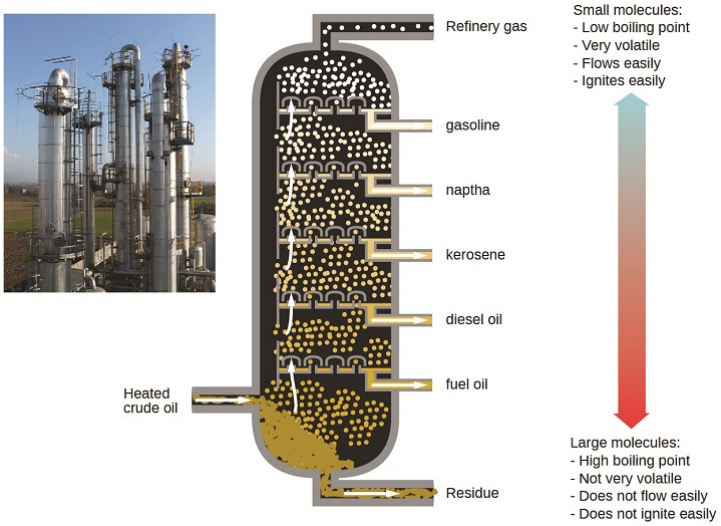

Figure **10.4.3**: Crude oil is a complex mixture that is separated by large-scale fractional distillation to isolate various simpler mixtures.

Depression of the Freezing Point of a Solvent

Solutions freeze at lower temperatures than pure liquids. This phenomenon is exploited in “de-icing” schemes that use salt (Figure 10.4.4), calcium chloride, or urea to melt ice on roads and sidewalks, and in the use of ethylene glycol as an “antifreeze” in automobile radiators. Seawater freezes at a lower temperature than fresh water, and so the Arctic and Antarctic oceans remain unfrozen even at temperatures below 0 °C (as do the body fluids of fish and other cold-blooded sea animals that live in these oceans).

Figure **10.4.4**: Rock salt (NaCl), calcium chloride ($CaCl_2$), or a mixture of the two are used to melt ice. (credit: modification of work by Eddie Welker)

Colligative Properties and De-Icing

Sodium chloride and its group 2 analogs calcium and magnesium chloride are often used to de-ice roadways and sidewalks, due to the fact that a solution of any one of these salts will have a freezing point lower than 0 °C, the freezing point of pure water. The group 2 metal salts are frequently mixed with the cheaper and more readily available sodium chloride (“rock salt”) for use on roads, since they tend to be somewhat less corrosive than the NaCl, and they provide a larger depression of the freezing point, since they dissociate to yield three particles per formula unit, rather than two particles like the sodium chloride.

Because these ionic compounds tend to hasten the corrosion of metal, they would not be a wise choice to use in antifreeze for the radiator in your car or to de-ice a plane prior to takeoff. For these applications, covalent compounds, such as ethylene or propylene glycol, are often used. The glycols used in radiator fluid not only lower the freezing point of the liquid, but they elevate the boiling point, making the fluid useful in both winter and summer. Heated glycols are often sprayed onto the surface of airplanes prior to takeoff in inclement weather in the winter to remove ice that has already formed and prevent the formation of more ice, which would be particularly dangerous if formed on the control surfaces of the aircraft (Video **10.4.1**).

***Video* 10.4.1:** *Freezing point depression is exploited to remove ice from the control surfaces of aircraft.*

Osmosis and Osmotic Pressure of Solutions

A number of natural and synthetic materials exhibit *selective permeation*, meaning that only molecules or ions of a certain size, shape, polarity, charge, and so forth, are capable of passing through (permeating) the material. Biological cell membranes provide elegant examples of selective permeation in nature, while dialysis tubing used to remove metabolic wastes from blood is a more simplistic technological example. Regardless of how they may be fabricated, these materials are generally referred to as semipermeable membranes.

Consider the apparatus illustrated in Figure **10.4.6**, in which samples of pure solvent and a solution are separated by a membrane that only solvent molecules may permeate. Solvent molecules will diffuse across the membrane in both directions. Since the concentration of *solvent* is greater in the pure solvent than the solution, these molecules will diffuse from the solvent side of the membrane to the solution side at a faster rate than they will in the reverse direction. The result is a net transfer of solvent molecules from the pure solvent to the solution. Diffusion-driven transfer of solvent molecules through a semipermeable membrane is a process known as osmosis.

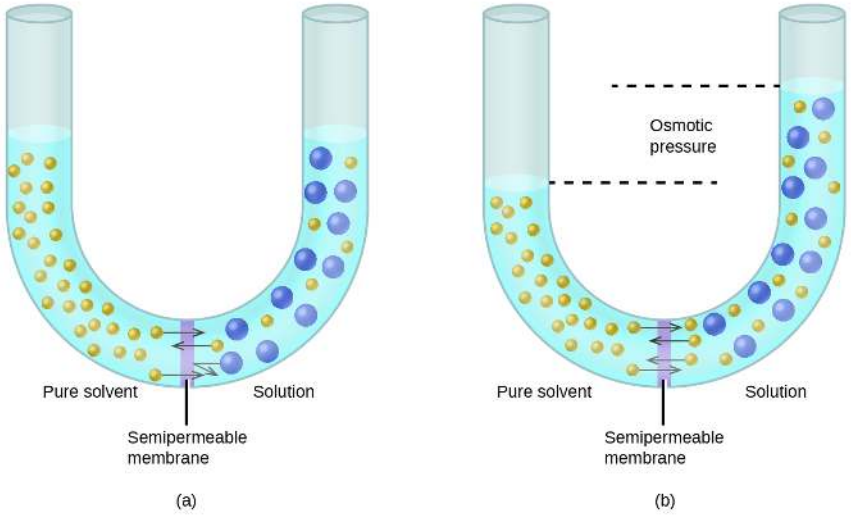

Figure **10.4.6**: Osmosis results in the transfer of solvent molecules from a sample of low (or zero) solute concentration to a sample of higher solute concentration.

When osmosis is carried out in an apparatus like that shown in Figure **10.4.6**, the volume of the solution increases as it becomes diluted by accumulation of solvent. This causes the level of the solution to rise, increasing its hydrostatic pressure (due to the weight of the column of solution in the tube) and resulting in a faster transfer of solvent molecules back to the pure solvent side. When the pressure reaches a value that yields a reverse solvent transfer rate equal to the osmosis rate, bulk transfer of solvent ceases. This pressure is called the osmotic pressure (**Π**) of the solution.

If a solution is placed in an apparatus like the one shown in Figure **10.4.7**, applying pressure greater than the osmotic pressure of the solution reverses the osmosis and pushes solvent molecules from the solution into the pure solvent. This technique of reverse osmosis is used for large-scale desalination of seawater and on smaller scales to produce high-purity tap water for drinking.

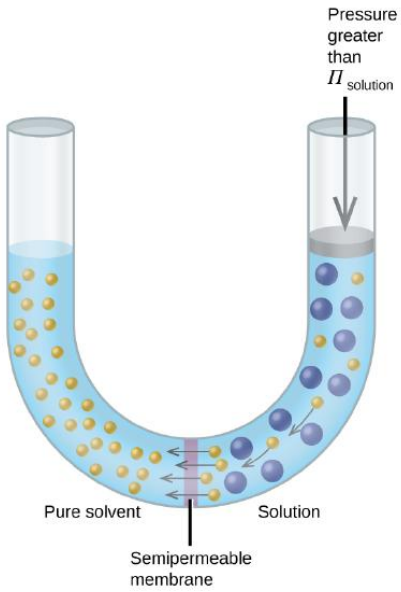

Figure **10.4.7**: Applying a pressure greater than the osmotic pressure of a solution will reverse osmosis. Solvent molecules from the solution are pushed into the pure solvent.

Examples of osmosis are evident in many biological systems because cells are surrounded by semipermeable membranes. Carrots and celery that have become limp because they have lost water can be made crisp again by placing them in water. Water moves into the carrot or celery cells by osmosis. A cucumber placed in a concentrated salt solution loses water by osmosis and absorbs some salt to become a pickle. Osmosis can also affect animal cells. Solute concentrations are particularly important when solutions are injected into the body. Solutes in body cell fluids and blood serum give these solutions an osmotic pressure of approximately 7.7 atm. Solutions injected into the body must have the same osmotic pressure as blood serum; that is, they should be isotonic with blood serum. If a less concentrated solution, a hypotonic solution, is injected in sufficient quantity to dilute the blood serum, water from the diluted serum passes into the blood cells by osmosis, causing the cells to expand and rupture. This process is called hemolysis. When a more concentrated solution, a hypertonic solution, is injected, the cells lose water to the more concentrated solution, shrivel, and possibly die in a process called *crenation* (Figure 11.5.8).

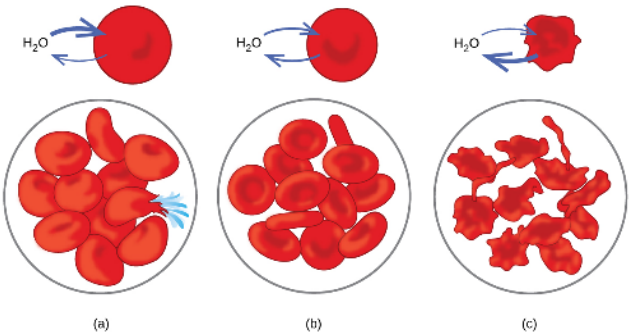

Figure **10.4.8**: Red blood cell membranes are water permeable and will (a) swell and possibly rupture in a hypotonic solution; (b) maintain normal volume and shape in an isotonic solution; and (c) shrivel and possibly die in a hypertonic solution. (credit a/b/c: modifications of work by “LadyofHats”/Wikimedia commons)

Colligative Properties of Electrolytes

As noted previously in this module, the colligative properties of a solution depend only on the number, not on the kind, of solute species dissolved. For example, 1 mole of any nonelectrolyte dissolved in 1 kilogram of solvent produces the same lowering of the freezing point as does 1 mole of any other nonelectrolyte. However, 1 mole of sodium chloride (an electrolyte) forms *2 moles* of ions when dissolved in solution. Each individual ion produces the same effect on the freezing point as a single molecule does.

Summary

Properties of a solution that depend only on the concentration of solute particles are called colligative properties. They include changes in the vapor pressure, boiling point, and freezing point of the solvent in the solution. The magnitudes of these properties depend only on the total concentration of solute particles in solution, not on the type of particles. The total concentration of solute particles in a solution also determines its osmotic pressure. This is the pressure that must be applied to the solution to prevent diffusion of molecules of pure solvent through a semipermeable membrane into the solution. Ionic compounds may not completely dissociate in solution due to activity effects, in which case observed colligative effects may be less than predicted.

Footnotes

1. A nonelectrolyte shown for comparison.

Glossary

boiling point elevation
elevation of the boiling point of a liquid by addition of a solute

colligative property
property of a solution that depends only on the concentration of a solute species

freezing point depression
lowering of the freezing point of a liquid by addition of a solute

hemolysis
rupture of red blood cells due to the accumulation of excess water by osmosis

hypertonic
of greater osmotic pressure

hypotonic
of less osmotic pressure

isotonic
of equal osmotic pressure

osmosis
diffusion of solvent molecules through a semipermeable membrane

osmotic pressure (*Π*)
opposing pressure required to prevent bulk transfer of solvent molecules through a semipermeable membrane

semipermeable membrane
a membrane that selectively permits passage of certain ions or molecules

Contributors

- Paul Flowers (University of North Carolina - Pembroke), Klaus Theopold (University of Delaware) and Richard Langley (Stephen F. Austin State University) with contributing authors. Textbook content produced by OpenStax College is licensed under a Creative Commons Attribution License 4.0 license. Download for free at http://cnx.org/contents/85abf193-2bd...a7ac8df6@9.110).

This page titled 10.4: Colligative Properties is shared under a CC BY license and was authored, remixed, and/or curated by OpenStax.

10.5: Colloids

Learning Objectives

- Describe the composition and properties of colloidal dispersions
- List and explain several technological applications of colloids

As a child, you may have made suspensions such as mixtures of mud and water, flour and water, or a suspension of solid pigments in water, known as tempera paint. These suspensions are heterogeneous mixtures composed of relatively large particles that are visible (or that can be seen with a magnifying glass). They are cloudy, and the suspended particles settle out after mixing. On the other hand, when we make a solution, we prepare a homogeneous mixture in which no settling occurs and in which the dissolved species are molecules or ions. Solutions exhibit completely different behavior from suspensions. A solution may be colored, but it is transparent, the molecules or ions are invisible, and they do not settle out on standing. A group of mixtures called colloids (or colloidal dispersions) exhibit properties intermediate between those of suspensions and solutions (Figure 10.5.1). The particles in a colloid are larger than most simple molecules; however, colloidal particles are small enough that they do not settle out upon standing.



Figure 10.5.1: (a) A solution is a homogeneous mixture that appears clear, such as the saltwater in this aquarium. (b) In a colloid, such as milk, the particles are much larger but remain dispersed and do not settle. (c) A suspension, such as mud, is a heterogeneous mixture of suspended particles that appears cloudy and in which the particles can settle. (credit a photo: modification of work by Adam Wimsatt; credit b photo: modification of work by Melissa Wiese; credit c photo: modification of work by Peter Burgess)

This figure contains three photos and correponding particle diagrams. In a, a photo of an aquarium containing fish is shown. The particle diagram beneath it shows 90 tiny red spheres. In b, a photo is shown of milk being poured into a cup. The corresponding particle diagram shows about 25 medium sized red spheres.In c, a photo is shown of two pairs of sandal clad feet in mud. The particle diagram below shows 10 fairly large red spheres.

The particles in a colloid are large enough to scatter light, a phenomenon called the Tyndall effect. This can make colloidal mixtures appear cloudy or opaque, such as the searchlight beams shown in Figure 10.5.2. Clouds are colloidal mixtures. They are composed of water droplets that are much larger than molecules, but that are small enough that they do not settle out.

Figure **10.5.2**: The paths of searchlight beams are made visible when light is scattered by colloidal-size particles in the air (fog, smoke, etc.). (credit: “Bahman”/Wikimedia Commons)

The term “colloid”—from the Greek words *kolla*, meaning “glue,” and *eidos*, meaning “like”—was first used in 1861 by Thomas Graham to classify mixtures such as starch in water and gelatin. Many colloidal particles are aggregates of hundreds or thousands of molecules, but others (such as proteins and polymer molecules) consist of a single extremely large molecule. The protein and synthetic polymer molecules that form colloids may have molecular masses ranging from a few thousand to many million atomic mass units.

Analogous to the identification of solution components as “solute” and “solvent,” the components of a colloid are likewise classified according to their relative amounts. The particulate component typically present in a relatively minor amount is called the dispersed phase and the substance or solution throughout which the particulate is dispersed is called the dispersion medium. Colloids may involve virtually any combination of physical states (gas in liquid, liquid in solid, solid in gas, etc.), as illustrated by the examples of colloidal systems given in Table **10.5.1**.

Table **10.5.2**: Examples of Colloidal Systems

Dispersed Phase	Dispersion Medium	Common Examples	Name
solid	gas	smoke, dust	—
solid	liquid	starch in water, some inks, paints, milk of magnesia	sol
solid	solid	some colored gems, some alloys	—
liquid	gas	clouds, fogs, mists, sprays	aerosol
liquid	liquid	milk, mayonnaise, butter	emulsion
liquid	solid	jellies, gels, pearl, opal (H_2O in SiO_2)	gel
gas	liquid	foams, whipped cream, beaten egg whites	foam
gas	solid	pumice, floating soaps	—

Preparation of Colloidal Systems

We can prepare a colloidal system by producing particles of colloidal dimensions and distributing these particles throughout a dispersion medium. Particles of colloidal size are formed by two methods:

1. Dispersion methods: that is, by breaking down larger particles. For example, paint pigments are produced by dispersing large particles by grinding in special mills.
2. Condensation methods: that is, growth from smaller units, such as molecules or ions. For example, clouds form when water molecules condense and form very small droplets.

A few solid substances, when brought into contact with water, disperse spontaneously and form colloidal systems. Gelatin, glue, starch, and dehydrated milk powder behave in this manner. The particles are already of colloidal size; the water simply disperses them. Powdered milk particles of colloidal size are produced by dehydrating milk spray. Some atomizers produce colloidal dispersions of a liquid in air.

We can prepare an emulsion by shaking together or blending two immiscible liquids. This breaks one liquid into droplets of colloidal size, which then disperse throughout the other liquid. Oil spills in the ocean may be difficult to clean up, partly because wave action can cause the oil and water to form an emulsion. In many emulsions, however, the dispersed phase tends to coalesce, form large drops, and separate. Therefore, emulsions are usually stabilized by an emulsifying agent, a substance that inhibits the coalescence of the dispersed liquid. For example, a little soap will stabilize an emulsion of kerosene in water. Milk is an emulsion of butterfat in water, with the protein casein as the emulsifying agent. Mayonnaise is an emulsion of oil in vinegar, with egg yolk components as the emulsifying agents.

Condensation methods form colloidal particles by aggregation of molecules or ions. If the particles grow beyond the colloidal size range, drops or precipitates form, and no colloidal system results. Clouds form when water molecules aggregate and form colloid-sized particles. If these water particles coalesce to form adequately large water drops of liquid water or crystals of solid water, they settle from the sky as rain, sleet, or snow. Many condensation methods involve chemical reactions. We can prepare a red colloidal suspension of iron(III) hydroxide by mixing a concentrated solution of iron(III) chloride with hot water:

$$\mathrm{Fe^{3+}_{(aq)} + 3Cl^-_{(aq)} + 6H_2O_{(l)} \longrightarrow Fe(OH)_{3(s)} + H_3O^+_{(aq)} + 3Cl^-_{(aq)}} \tag{10.5.1}$$

A colloidal gold sol results from the reduction of a very dilute solution of gold(III) chloride by a reducing agent such as formaldehyde, tin(II) chloride, or iron(II) sulfate:

$$\mathrm{Au^{3+} + 3\,e^- \rightarrow Au} \tag{10.5.2}$$

Some gold sols prepared in 1857 are still intact (the particles have not coalesced and settled), illustrating the long-term stability of many colloids.

Soaps and Detergents

Pioneers made soap by boiling fats with a strongly basic solution made by leaching potassium carbonate, $\mathrm{K_2CO_3}$, from wood ashes with hot water. Animal fats contain polyesters of fatty acids (long-chain carboxylic acids). When animal fats are treated with a base like potassium carbonate or sodium hydroxide, glycerol and salts of fatty acids such as palmitic, oleic, and stearic acid are formed. The salts of fatty acids are called soaps. The sodium salt of stearic acid, sodium stearate, has the formula $\mathrm{C_{17}H_{35}CO_2Na}$ and contains an uncharged nonpolar hydrocarbon chain, the $\mathrm{C_{17}H_{35}-}$ unit, and an ionic carboxylate group, the $\mathrm{-CO_2^-}$ unit (Figure 10.5.3).

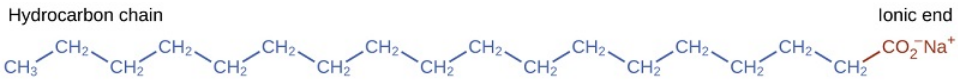

sodium stearate (soap)

Figure 10.5.3: Soaps contain a nonpolar hydrocarbon end (blue) and an ionic end (red). The ionic end is a carboxylate group. The length of the hydrocarbon end can vary from soap to soap.

This figure shows a structural formula for soap known as sodium stearate. A hydrocarbon chain composed of 18 carbon atoms and 35 hydrogen atoms is shown with an ionic end with 2 oxygen atoms and a negative charge. A positively charged N a superscript plus is also shown at the ionic end.

*Deterg*ents (soap substitutes) also contain nonpolar hydrocarbon chains, such as $\mathrm{C_{12}H_{25}—}$, and an ionic group, such as a sulfate $\mathrm{—OSO_3^-}$, or a sulfonate $\mathrm{—SO_3^-}$ (Figure 10.5.4). Soaps form insoluble calcium and magnesium compounds in hard water; detergents form water-soluble products—a definite advantage for detergents.

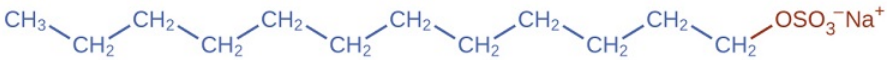

sodium lauryl sulfate (detergent)

Figure **10.5.4**: Detergents contain a nonpolar hydrocarbon end (blue) and an ionic end (red). The ionic end can be either a sulfate or a sulfonate. The length of the hydrocarbon end can vary from detergent to detergent.

This figure shows a structural formula for a detergent known as sodium lauryl sulfate. A hydrocarbon chain composed of 12 carbon atoms and 25 hydrogen atoms is shown with an ionic end involving a negatively charged sulfur and four oxygen atoms at the ionic end of the chain. A positively charged N a superscript plus is also shown at the ionic end.

The cleaning action of soaps and detergents can be explained in terms of the structures of the molecules involved. The hydrocarbon (nonpolar) end of a soap or detergent molecule dissolves in, or is attracted to, nonpolar substances such as oil, grease, or dirt particles. The ionic end is attracted by water (polar), illustrated in Figure **10.5.5**. As a result, the soap or detergent molecules become oriented at the interface between the dirt particles and the water so they act as a kind of bridge between two different kinds of matter, nonpolar and polar. Molecules such as this are termed amphiphilic since they have both a hydrophobic (“water-fearing”) part and a hydrophilic (“water-loving”) part. As a consequence, dirt particles become suspended as colloidal particles and are readily washed away.

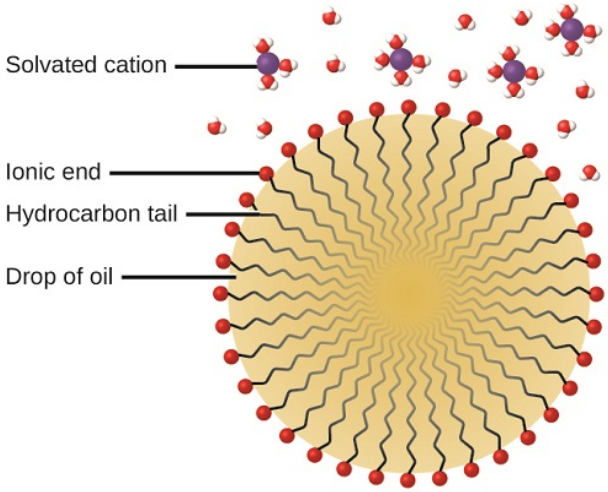

Figure **10.5.5**: This diagrammatic cross section of an emulsified drop of oil in water shows how soap or detergent acts as an emulsifier.

This figure shows a drop of oil in which approximately thirty hydrocarbon tails are oriented toward the center of the drop with ionic ends indicated as tiny red spheres on the surface of the oil drop. Solvated cations are indicated as purple spheres surrounded by clusters of H subscript 2 subscript O molecules shown as tiny clusters of red central oxygen spheres with two white hydrogen spheres attached.

Deepwater Horizon Oil Spill

The blowout of the Deepwater Horizon oil drilling rig on April 20, 2010, in the Gulf of Mexico near Mississippi began the largest marine oil spill in the history of the petroleum. In the 87 days following the blowout, an estimated 4.9 million barrels (210 million gallons) of oil flowed from the ruptured well 5000 feet below the water’s surface. The well was finally declared sealed on September 19, 2010.

Crude oil is immiscible with and less dense than water, so the spilled oil rose to the surface of the water. Floating booms, skimmer ships, and controlled burns were used to remove oil from the water’s surface in an attempt to protect beaches and wetlands along the Gulf coast. In addition to removal of the oil, attempts were also made to lessen its environmental impact by rendering it “soluble” (in the loose sense of the term) and thus allowing it to be diluted to hopefully less harmful levels by the vast volume of ocean water. This approach used 1.84 million gallons of the oil dispersant Corexit 9527, most of which was injected underwater at the site of the leak, with small amounts being sprayed on top of the spill. Corexit 9527 contains 2-butoxyethanol ($C_6H_{14}O_2$), an amphiphilic molecule whose polar and nonpolar ends are useful for emulsifying oil into small droplets, increasing the surface area of the oil and making it more available to marine bacteria for digestion (Figure **10.5.6**). While this approach avoids many of the immediate hazards that bulk oil poses to marine and coastal ecosystems, it introduces

the possibility of long-term effects resulting from the introduction of the complex and potential toxic components of petroleum into the ocean's food chain. A number of organizations are involved in monitoring the extended impact of this oil spill, including the National Oceanic and Atmospheric Administration.

(a) (b) (c)

Figure 10.5.6: (a) This NASA satellite image shows the oil slick from the Deepwater Horizon spill. (b) A US Air Force plane sprays Corexit, a dispersant. (c) The molecular structure of 2-butoxyethanol is shown. (credit a: modification of work by "NASA, FT2, demis.nl"/Wikimedia Commons; credit b: modification of work by "NASA/MODIS Rapid Response Team"/Wikimedia Commons)

Electrical Properties of Colloidal Particles

Dispersed colloidal particles are often electrically charged. A colloidal particle of iron(III) hydroxide, for example, does not contain enough hydroxide ions to compensate exactly for the positive charges on the iron(III) ions. Thus, each individual colloidal particle bears a positive charge, and the colloidal dispersion consists of charged colloidal particles and some free hydroxide ions, which keep the dispersion electrically neutral. Most metal hydroxide colloids have positive charges, whereas most metals and metal sulfides form negatively charged dispersions. All colloidal particles in any one system have charges of the same sign. This helps keep them dispersed because particles containing like charges repel each other.

We can take advantage of the charge on colloidal particles to remove them from a variety of mixtures. If we place a colloidal dispersion in a container with charged electrodes, positively charged particles, such as iron(III) hydroxide particles, would move to the negative electrode. There, the colloidal particles lose their charge and coagulate as a precipitate.

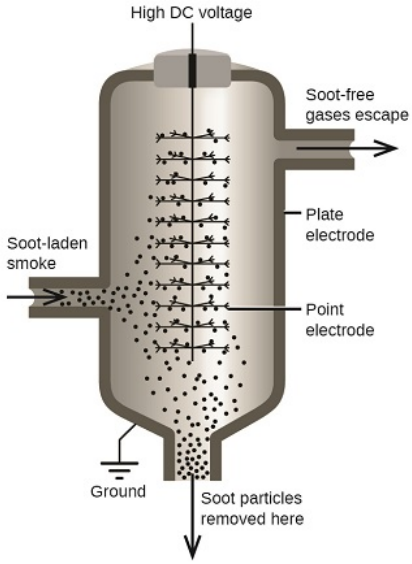

Figure 10.5.7: In a Cottrell precipitator, positively and negatively charged particles are attracted to highly charged electrodes, where they are neutralized and deposited as dust.

This figure shows a diagram of a Cottrell precipitator. An arrow pointing into a cylindrical chamber shows the path of soot laden smoke. In the presence of high DC voltage and both point and plate electrodes, soot particles are removed at the bottom of the chamber and soot free air exits the top. A photo shows the honeycomb electrodes of a modern electrostatic precipitator.

The carbon and dust particles in smoke are often colloidally dispersed and electrically charged. The charged particles are attracted to highly charged electrodes, where they are neutralized and deposited as dust (Figure 10.5.7. This is one of the important methods used to clean up the smoke from a variety of industrial processes. The process is also important in the recovery of valuable

products from the smoke and flue dust of smelters, furnaces, and kilns. There are also ionic air filters designed for home use to improve indoor air quality.

Gels

When we make gelatin, such as Jell-O, we are making a type of colloid (Figure **10.5.8**). Gelatin sets on cooling because the hot aqueous mixture of gelatin coagulates as it cools and the whole mass, including the liquid, sets to an extremely viscous body known as a gel, a colloid in which the dispersing medium is a solid and the dispersed phase is a liquid. It appears that the fibers of the dispersing medium form a complex three-dimensional network, the interstices being filled with the liquid medium or a dilute solution of the dispersing medium. Because the formation of a gel is accompanied by the taking up of water or some other solvent, the gel is said to be hydrated or solvated.

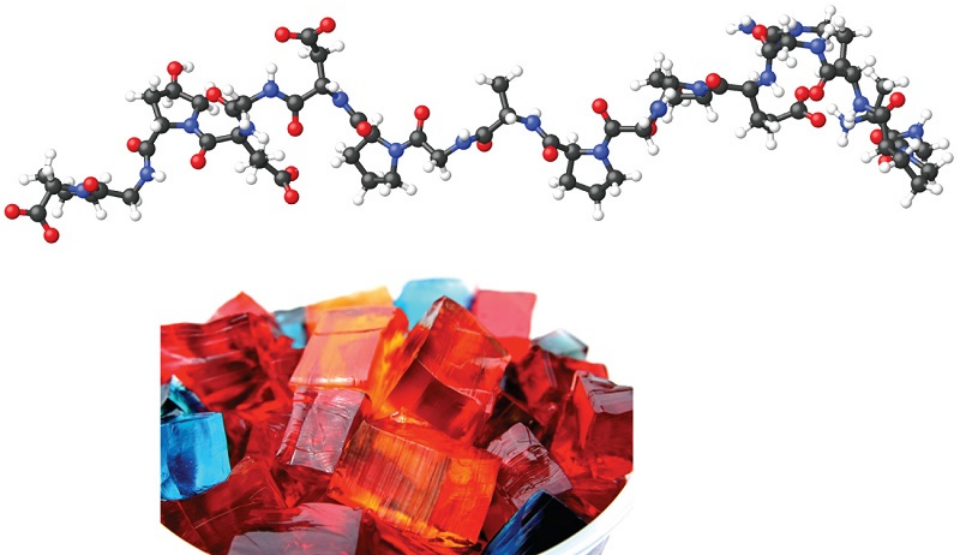

Figure **10.5.8**: Gelatin desserts are colloids in which an aqueous solution of sweeteners and flavors is dispersed throughout a medium of solid proteins. (credit photo: modification of work by Steven Depolo).

In this figure, a large molecular model of gelatin is shown with black carbon atoms, red oxygen atoms, white hydrogen atoms, and blue nitrogen atoms. A photo is shown of gelatin dessert cut into colorful rectangles.

Pectin, a carbohydrate from fruit juices, is a gel-forming substance important in jelly making. Silica gel, a colloidal dispersion of hydrated silicon dioxide, is formed when dilute hydrochloric acid is added to a dilute solution of sodium silicate. Canned Heat is a gel made by mixing alcohol and a saturated aqueous solution of calcium acetate.

Summary

Colloids are mixtures in which one or more substances are dispersed as relatively large solid particles or liquid droplets throughout a solid, liquid, or gaseous medium. The particles of a colloid remain dispersed and do not settle due to gravity, and they are often electrically charged. Colloids are widespread in nature and are involved in many technological applications.

Glossary

amphiphilic

molecules possessing both hydrophobic (nonpolar) and a hydrophilic (polar) parts

colloid

(also, colloidal dispersion) mixture in which relatively large solid or liquid particles are dispersed uniformly throughout a gas, liquid, or solid

dispersion medium

solid, liquid, or gas in which colloidal particles are dispersed

dispersed phase

substance present as relatively large solid or liquid particles in a colloid

emulsifying agent

amphiphilic substance used to stabilize the particles of some emulsions

emulsion

colloid formed from immiscible liquids

gel

colloidal dispersion of a liquid in a solid

Tyndall effect

scattering of visible light by a colloidal dispersion

This page titled 10.5: Colloids is shared under a CC BY license and was authored, remixed, and/or curated by OpenStax.

- **11.6: Colloids** by OpenStax is licensed CC BY 4.0. Original source: https://openstax.org/details/books/chemistry-2e.

CHAPTER OVERVIEW

11: Kinetics

A general chemistry Libretexts Textmap organized around the textbook
General Chemistry -Atoms First
By OpenStax

I II III IV V VI VII VIII IX X XI XII XIII XIV XV XVI XVII XVIII XIX XX XXI ● **Homework**

Chemical kinetics is the study of rates of chemical processes and includes investigations of how different experimental conditions can influence the speed of a chemical reaction and yield information about the reaction's mechanism and transition states, as well as the construction of mathematical models that can describe the characteristics of a chemical reaction.

Topic hierarchy

11.1: Prelude to Kinetics
11.2: Chemical Reaction Rates
11.3: Factors Affecting Reaction Rates
11.4: Collision Theory
11.5: Catalysis

Contributors

- Paul Flowers (University of North Carolina - Pembroke), Klaus Theopold (University of Delaware) and Richard Langley (Stephen F. Austin State University) with contributing authors. Textbook content produced by OpenStax College is licensed under a Creative Commons Attribution License 4.0 license. Download for free at http://cnx.org/contents/85abf193-2bd...a7ac8df6@9.110).

This page titled 11: Kinetics is shared under a CC BY license and was authored, remixed, and/or curated by OpenStax.

11.1: Prelude to Kinetics

The lizard in the photograph is not simply enjoying the sunshine or working on its tan. The heat from the sun's rays is critical to the lizard's survival. A warm lizard can move faster than a cold one because the chemical reactions that allow its muscles to move occur more rapidly at higher temperatures. In the absence of warmth, the lizard is an easy meal for predators.

Figure **11.1.1**: *An agama lizard basks in the sun. As its body warms, the chemical reactions of its metabolism speed up.*

From baking a cake to determining the useful lifespan of a bridge, rates of chemical reactions play important roles in our understanding of processes that involve chemical changes. When planning to run a chemical reaction, we should ask at least two questions. The first is: "Will the reaction produce the desired products in useful quantities?" The second question is: "How rapidly will the reaction occur?" A reaction that takes 50 years to produce a product is about as useful as one that never gives a product at all. A third question is often asked when investigating reactions in greater detail: "What specific molecular-level processes take place as the reaction occurs?" Knowing the answer to this question is of practical importance when the yield or rate of a reaction needs to be controlled.

The study of chemical kinetics concerns the second and third questions—that is, the rate at which a reaction yields products and the molecular-scale means by which a reaction occurs. In this chapter, we will examine the factors that influence the rates of chemical reactions, the mechanisms by which reactions proceed, and the quantitative techniques used to determine and describe the rate at which reactions occur.

- Paul Flowers (University of North Carolina - Pembroke), Klaus Theopold (University of Delaware) and Richard Langley (Stephen F. Austin State University) with contributing authors. Textbook content produced by OpenStax College is licensed under a Creative Commons Attribution License 4.0 license. Download for free at http://cnx.org/contents/85abf193-2bd...a7ac8df6@9.110).

This page titled 11.1: Prelude to Kinetics is shared under a CC BY license and was authored, remixed, and/or curated by OpenStax.

- **12.1: Prelude to Kinetics** by OpenStax is licensed CC BY 4.0. Original source: https://openstax.org/details/books/chemistry-2e.

11.3: Factors Affecting Reaction Rates

Learning Objectives

- Describe the effects of chemical nature, physical state, temperature, concentration, and catalysis on reaction rates

The rates at which reactants are consumed and products are formed during chemical reactions vary greatly. We can identify five factors that affect the rates of chemical reactions: the chemical nature of the reacting substances, the state of subdivision (one large lump versus many small particles) of the reactants, the temperature of the reactants, the concentration of the reactants, and the presence of a catalyst.

The Chemical Nature of the Reacting Substances

The rate of a reaction depends on the nature of the participating substances. Reactions that appear similar may have different rates under the same conditions, depending on the identity of the reactants. For example, when small pieces of the metals iron and sodium are exposed to air, the sodium reacts completely with air overnight, whereas the iron is barely affected. The active metals calcium and sodium both react with water to form hydrogen gas and a base. Yet calcium reacts at a moderate rate, whereas sodium reacts so rapidly that the reaction is almost explosive.

The State of Subdivision of the Reactants

Except for substances in the gaseous state or in solution, reactions occur at the boundary, or interface, between two phases. Hence, the rate of a reaction between two phases depends to a great extent on the surface contact between them. A finely divided solid has more surface area available for reaction than does one large piece of the same substance. Thus a liquid will react more rapidly with a finely divided solid than with a large piece of the same solid. For example, large pieces of iron react slowly with acids; finely divided iron reacts much more rapidly (Figure **11.3.1**). Large pieces of wood smolder, smaller pieces burn rapidly, and saw dust burns explosively.

Figure **11.3.1**: (a) Iron powder reacts rapidly with dilute hydrochloric acid and produces bubbles of hydrogen gas because the powder has a large total area: 2Fe(s) + 6HCl(aq) ⟶ 2FeCl3(aq) + 3H2(g). (surfaceb) An iron nail reacts more slowly.

This figure shows two photos labeled (a) and (b). Photo (a) shows the bottom of a test tube. The test tube is filled with a dark gas, and there is a dark substance and bubbles in the bottom. Photo (b) shows a rod and bubbles in a test tube similar to photo (a), but the gas in the test tube is not as dark.

***Video* 11.3.1**: *The reaction of cesium with water in slow motion and a discussion of how the state of reactants and particle size affect reaction rates.*

Temperature of the Reactants

Chemical reactions typically occur faster at higher temperatures. Food can spoil quickly when left on the kitchen counter. However, the lower temperature inside of a refrigerator slows that process so that the same food remains fresh for days. We use a burner or a hot plate in the laboratory to increase the speed of reactions that proceed slowly at ordinary temperatures. In many cases, an increase in temperature of only 10 °C will approximately double the rate of a reaction in a homogeneous system.

Concentrations of the Reactants

The rates of many reactions depend on the concentrations of the reactants. Rates usually increase when the concentration of one or more of the reactants increases. For example, calcium carbonate ($\mathbf{CaCO_3}$) deteriorates as a result of its reaction with the pollutant sulfur dioxide. The rate of this reaction depends on the amount of sulfur dioxide in the air (Figure **11.3.2**). As an acidic oxide, sulfur dioxide combines with water vapor in the air to produce sulfurous acid in the following reaction:

$$\mathbf{SO_{2(g)} + H_2O_{(g)} \longrightarrow H_2SO_{3(aq)}} \tag{11.3.1}$$

Calcium carbonate reacts with sulfurous acid as follows:

$$\mathbf{CaCO_{3(s)} + H_2SO_{3(aq)} \longrightarrow CaSO_{3(aq)} + CO_{2(g)} + H_2O_{(l)}} \tag{11.3.2}$$

In a polluted atmosphere where the concentration of sulfur dioxide is high, calcium carbonate deteriorates more rapidly than in less polluted air. Similarly, phosphorus burns much more rapidly in an atmosphere of pure oxygen than in air, which is only about 20% oxygen.



Figure **11.3.2**: Statues made from carbonate compounds such as limestone and marble typically weather slowly over time due to the actions of water, and thermal expansion and contraction. However, pollutants like sulfur dioxide can accelerate weathering. As the concentration of air pollutants increases, deterioration of limestone occurs more rapidly. (credit: James P Fisher III).

A photograph is shown of an angel statue. While some details of the statue, including facial features, are present, effects of weathering appear to be diminishing these features.

***Video* 11.3.2**: *Phosphorous burns rapidly in air, but it will burn even more rapidly if the concentration of oxygen in is higher.*

The Presence of a Catalyst

Hydrogen peroxide solutions foam when poured onto an open wound because substances in the exposed tissues act as catalysts, increasing the rate of hydrogen peroxide's decomposition. However, in the absence of these catalysts (for example, in the bottle in the medicine cabinet) complete decomposition can take months. A catalyst is a substance that increases the rate of a chemical reaction by lowering the activation energy without itself being consumed by the reaction. Activation energy is the minimum amount of energy required for a chemical reaction to proceed in the forward direction. A catalyst increases the reaction rate by providing an alternative pathway or mechanism for the reaction to follow (Figure **11.3.3**). Catalysis will be discussed in greater detail later in this chapter as it relates to mechanisms of reactions.

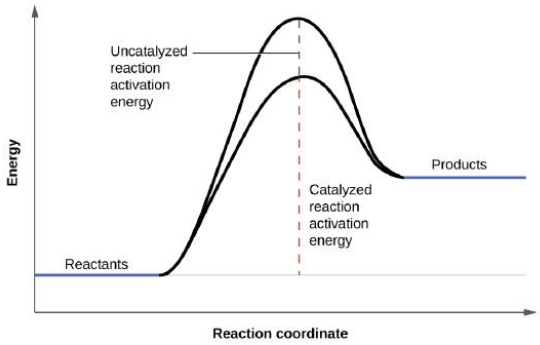

Figure **11.3.3**: The presence of a catalyst increases the rate of a reaction by lowering its activation energy.

A graph is shown with the label, "Reaction coordinate," on the x-axis. The x-axis is depicted as an arrow. The y-axis is also an arrow and is labeled, "Energy." There is a horizontal line that runs the width of the graph and appears just above the x-axis. A segment of this line is blue and is labeled, "Reactants." From the right end of this line segment, a solid black, concave down curve is shown which reaches the level just below the end of the y-axis. The curve ends at another short, blue line labeled, "Products." The "Products" line appears at a higher level than the "Reactants" line. An arrow extends from the horizontal line to the apex of the curve. The arrow is labeled, "Uncatalyzed reaction activation energy." A second, black concave down curve is shown. This curve also meets the reactants and products blue line segments, but only extends to about two-thirds the height of the initial curve. From the horizontal line is another arrow pointing to the apex of the second curve. This arrow is labeled, "Catalyzed reaction activation energy."

> *Chemical reactions occur when molecules collide with each other and undergo a chemical transformation. Before physically performing a reaction in a laboratory, scientists can use molecular modeling simulations to predict how the parameters discussed earlier will influence the rate of a reaction. Use the PhET Reactions & Rates interactive to explore how temperature, concentration, and the nature of the reactants affect reaction rates.*

Summary

The rate of a chemical reaction is affected by several parameters. Reactions involving two phases proceed more rapidly when there is greater surface area contact. If temperature or reactant concentration is increased, the rate of a given reaction generally increases as well. A catalyst can increase the rate of a reaction by providing an alternative pathway that causes the activation energy of the reaction to decrease.

Glossary

catalyst

substance that increases the rate of a reaction without itself being consumed by the reaction

This page titled 11.3: Factors Affecting Reaction Rates is shared under a CC BY license and was authored, remixed, and/or curated by OpenStax.

- **12.3: Factors Affecting Reaction Rates** by OpenStax is licensed CC BY 4.0. Original source: https://openstax.org/details/books/chemistry-2e.

11.4: Collision Theory

Skills to Develop

- Use the postulates of collision theory to explain the effects of physical state, temperature, and concentration on reaction rates
- Define the concepts of activation energy and transition state

We should not be surprised that atoms, molecules, or ions must collide before they can react with each other. Atoms must be close together to form chemical bonds. This simple premise is the basis for a very powerful theory that explains many observations regarding chemical kinetics, including factors affecting reaction rates. Collision theory is based on the following postulates:

postulates of Collision theory

1. The rate of a reaction is proportional to the rate of reactant collisions:

$$\text{reaction rate} \propto \frac{\#\,\text{collisions}}{\text{time}} \tag{11.4.1}$$

2. The reacting species must collide in an orientation that allows contact between the atoms that will become bonded together in the product.
3. The collision must occur with adequate energy to permit mutual penetration of the reacting species' valence shells so that the electrons can rearrange and form new bonds (and new chemical species).

We can see the importance of the two physical factors noted in postulates 2 and 3, the orientation and energy of collisions, when we consider the reaction of carbon monoxide with oxygen:

$$2\,CO(g) + O_2(g) \longrightarrow 2\,CO_2(g) \tag{11.4.2}$$

Carbon monoxide is a pollutant produced by the combustion of hydrocarbon fuels. To reduce this pollutant, automobiles have catalytic converters that use a catalyst to carry out this reaction. It is also a side reaction of the combustion of gunpowder that results in muzzle flash for many firearms. If carbon monoxide and oxygen are present in sufficient quantity, the reaction is spontaneous at high temperature and pressure.

The first step in the gas-phase reaction between carbon monoxide and oxygen is a collision between the two molecules:

$$CO(g) + O_2(g) \longrightarrow CO_2(g) + O(g) \tag{11.4.3}$$

Although there are many different possible orientations the two molecules can have relative to each other, consider the two presented in Figure 11.4.1. In the first case, the oxygen side of the carbon monoxide molecule collides with the oxygen molecule. In the second case, the carbon side of the carbon monoxide molecule collides with the oxygen molecule. The second case is clearly more likely to result in the formation of carbon dioxide, which has a central carbon atom bonded to two oxygen atoms (O=C=O). This is a rather simple example of how important the orientation of the collision is in terms of creating the desired product of the reaction.

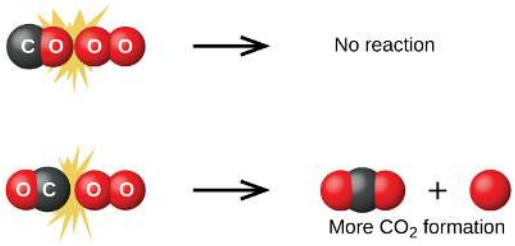

Figure 11.4.1: Illustrated are two collisions that might take place between carbon monoxide and oxygen molecules. The orientation of the colliding molecules partially determines whether a reaction between the two molecules will occur.

If the collision does take place with the correct orientation, there is still no guarantee that the reaction will proceed to form carbon dioxide. Every reaction requires a certain amount of activation energy for it to proceed in the forward direction, yielding an appropriate activated complex along the way. As Figure 11.4.2 demonstrates, even a collision with the correct orientation can fail to form the reaction product. In the study of reaction mechanisms, each of these three arrangements of atoms is called a proposed activated complex or transition state.

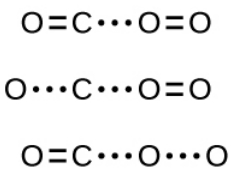

Figure 11.4.2: Possible transition states (activated complexes) for carbon monoxide reacting with oxygen to form carbon dioxide. Solid lines represent covalent bonds, while dotted lines represent unstable orbital overlaps that may, or may not, become covalent bonds as product is formed. In the first two examples in this figure, the O=O double bond is not impacted; therefore, carbon dioxide cannot form. The third proposed transition state will result in the formation of carbon dioxide if the third "extra" oxygen atom separates from the rest of the molecule.

In most circumstances, it is impossible to isolate or identify a transition state or activated complex. In the reaction between carbon monoxide and oxygen to form carbon dioxide, activated complexes have only been observed spectroscopically in systems that utilize a heterogeneous catalyst. The gas-phase reaction occurs too rapidly to isolate any such chemical compound.

Collision theory explains why most reaction rates increase as concentrations increase. With an increase in the concentration of any reacting substance, the chances for collisions between molecules are increased because there are more molecules per unit of volume. More collisions mean a faster reaction rate, assuming the energy of the collisions is adequate.

Activation Energy

The minimum energy necessary to form a product during a collision between reactants is called the activation energy (E_a). The kinetic energy of reactant molecules plays an important role in a reaction because the energy necessary to form a product is provided by a collision of a reactant molecule with another reactant molecule. (In single-reactant reactions, activation energy may be provided by a collision of the reactant molecule with the wall of the reaction vessel or with molecules of an inert contaminant.) If the activation energy is much larger than the average kinetic energy of the molecules, the reaction will occur slowly: Only a few fast-moving molecules will have enough energy to react. If the activation energy is much smaller than the average kinetic energy of the molecules, the fraction of molecules possessing the necessary kinetic energy will be large; most collisions between molecules will result in reaction, and the reaction will occur rapidly.

Figure 11.4.3 shows the energy relationships for the general reaction of a molecule of A with a molecule of B to form molecules of C and D:

$$A + B \longrightarrow C + D \tag{11.4.4}$$

The figure shows that the energy of the transition state is higher than that of the reactants A and B by an amount equal to E_a, the activation energy. Thus, the sum of the kinetic energies of A and B must be **equal to or greater** than E_a to reach the transition state. After the transition state has been reached, and as C and D begin to form, the system loses energy until its total energy is lower than that of the initial mixture. This lost energy is transferred to other molecules, giving them enough energy to reach the transition state. The forward reaction (that between molecules A and B) therefore tends to take place readily once the reaction has started. In Figure 11.4.3, ΔH represents the difference in enthalpy between the reactants (A and B) and the products (C and D). The sum of E_a and ΔH represents the activation energy for the reverse reaction:

$$C + D \longrightarrow A + B \tag{11.4.5}$$

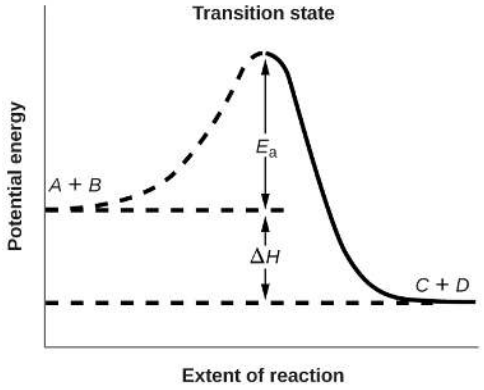

Figure **11.4.3**: This graph shows the potential energy relationships for the reaction $A + B \longrightarrow C + D$. *The dashed portion of the curve represents the energy of the system with a molecule of A and a molecule of B present, and the solid portion the energy of the system with a molecule of C and a molecule of D present. The activation energy for the forward reaction is represented by E_a. The activation energy for the reverse reaction is greater than that for the forward reaction by an amount equal to ΔH. The curve's peak represents the transition state.*

Summary

Chemical reactions require collisions between reactant species. These reactant collisions must be of proper orientation and sufficient energy in order to result in product formation. Collision theory provides a simple but effective explanation for the effect of many experimental parameters on reaction rates. The Arrhenius equation describes the relation between a reaction's rate constant and its activation energy, temperature, and dependence on collision orientation.

Glossary

Transition state

unstable combination of reactant species representing the highest energy state of a reaction system

activation energy (E_a)

energy necessary in order for a reaction to take place

collision theory

model that emphasizes the energy and orientation of molecular collisions to explain and predict reaction kinetics

Contributors

- Paul Flowers (University of North Carolina - Pembroke), Klaus Theopold (University of Delaware) and Richard Langley (Stephen F. Austin State University) with contributing authors. Textbook content produced by OpenStax College is licensed under a Creative Commons Attribution License 4.0 license. Download for free at http://cnx.org/contents/85abf193-2bd...a7ac8df6@9.110).

This page titled 11.4: Collision Theory is shared under a CC BY license and was authored, remixed, and/or curated by OpenStax.

11.5: Catalysis

Learning Objectives

- Explain the function of a catalyst in terms of reaction mechanisms and potential energy diagrams
- List examples of catalysis in natural and industrial processes

We have seen that the rate of many reactions can be accelerated by catalysts. A catalyst speeds up the rate of a reaction by lowering the activation energy; in addition, the catalyst is regenerated in the process. Several reactions that are thermodynamically favorable in the absence of a catalyst only occur at a reasonable rate when a catalyst is present. One such reaction is catalytic hydrogenation, the process by which hydrogen is added across an alkene C=C bond to afford the saturated alkane product. A comparison of the reaction coordinate diagrams (also known as energy diagrams) for catalyzed and uncatalyzed alkene hydrogenation is shown in Figure **11.5.1**.

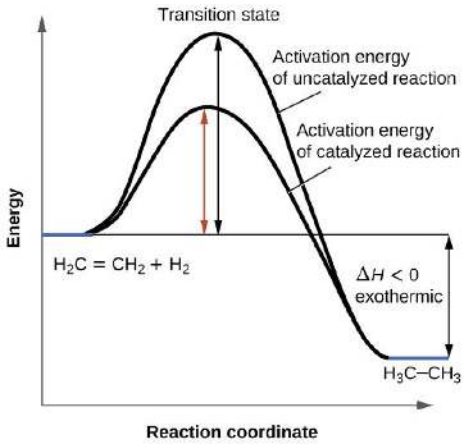

Figure **11.5.1**: This graph compares the reaction coordinates for catalyzed and uncatalyzed alkene hydrogenation.

A graph is shown with the label, “Reaction coordinate,” on the x-axis and the label,“Energy,” on the y-axis. Approximately half-way up the y-axis, a short portion of a black concave down curve which has a horizontal line extended from it across the graph. The left end of this line is labeled “H subscript 2 C equals C H subscript 2 plus H subscript 2.” The black concave down curve extends upward to reach a maximum near the height of the y-axis. The peak of this curve is labeled, “Transition state.” A double sided arrow extends from the horizontal line to the peak of the curve. This arrow is labeled, “Activation energy of Uncatalyzed reation.” From the peak, the curve continues downward to a second horizontally flattened region well below the origin of the curve near the x-axis. This flattened region is shaded in blue and is labeled “H subscript 3 C dash C H subscript 3.” A double sided arrow is drawn from the lowers part of this curve at the far right of the graph to the line extending across the graph above it. This arrow is labeled, “capital delta H less than 0 : exothermic.” A second curve is drawn with the same flattened regions at the start and end of the curve. The height of this curve is about two-thirds the height of the first curve. A double sided arrow is drawn from the horizontal line that originates at the left side of the graph to the peak of this second curve. This arrow is labeled, “Activation energy of catalyzed reaction.”

Catalysts function by providing an alternate reaction mechanism that has a lower activation energy than would be found in the absence of the catalyst. In some cases, the catalyzed mechanism may include additional steps, as depicted in the reaction diagrams shown in Figure **11.5.2** This lower activation energy results in an increase in rate as described by the Arrhenius equation. Note that a catalyst decreases the activation energy for both the forward and the reverse reactions and hence *accelerates both the forward and the reverse reactions*. Consequently, the presence of a catalyst will permit a system to reach equilibrium more quickly, but it has no effect on the position of the equilibrium as reflected in the value of its equilibrium constant (see the later chapter on chemical equilibrium).

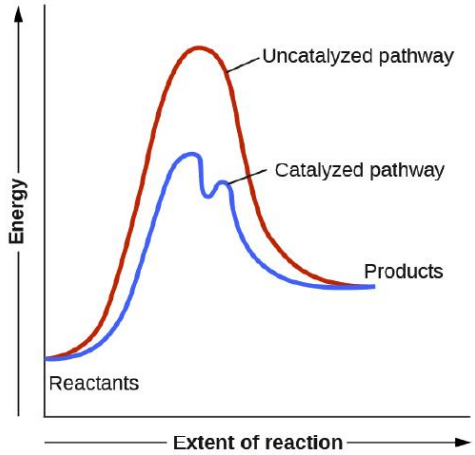

Figure **11.5.2**: This potential energy diagram shows the effect of a catalyst on the activation energy. The catalyst provides a different reaction path with a lower activation energy. As shown, the catalyzed pathway involves a two-step mechanism (note the presence of two transition states) and an intermediate species (represented by the valley between the two transitions states).

A graph is shown with the label, “Extent of reaction,” appearing in a right pointing arrow below the x-axis and the label, “Energy,” in an upward pointing arrow just left of the y-axis. Approximately one-fifth of the way up the y-axis, a very short, somewhat flattened portion of both a red and a blue curve are shown. This region is labeled “Reactants.” A red concave down curve extends upward to reach a maximum near the height of the y-axis. This curve is labeled, “Uncatalyzed pathway.” From the peak, the curve continues downward to a second horizontally flattened region at a height of about one-third the height of the y-axis. This flattened region is labeled, “Products.” A second curve is drawn in blue with the same flattened regions at the start and end of the curve. The height of this curve is about two-thirds the height of the first curve and just right of its maximum, the curve dips low, then rises back and continues a downward trend at a lower height, but similar to that of the red curve. This blue curve is labeled, “Catalyzed pathway.”

Example 11.5.1: Using Reaction Diagrams to Compare Catalyzed Reactions

The two reaction diagrams here represent the same reaction: one without a catalyst and one with a catalyst. Identify which diagram suggests the presence of a catalyst, and determine the activation energy for the catalyzed reaction:

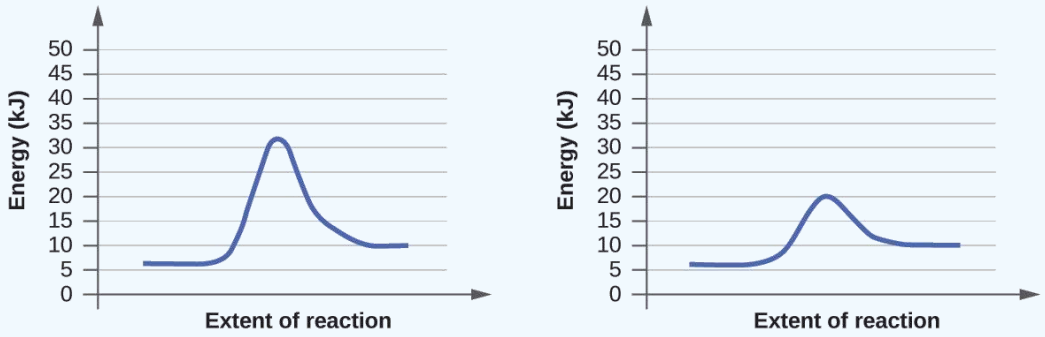

In this figure, two graphs are shown. The x-axes are labeled, “Extent of reaction,” and the y-axes are labeled, “Energy (k J).” The y-axes are marked off from 0 to 50 in intervals of five. In a, a blue curve is shown. It begins with a horizontal segment at about 6. The curve then rises sharply near the middle to reach a maximum of about 32 and similarly falls to another horizontal segment at about 10. In b, the curve begins and ends similarly, but the maximum reached near the center of the graph is only 20.

Solution

A catalyst does not affect the energy of reactant or product, so those aspects of the diagrams can be ignored; they are, as we would expect, identical in that respect. There is, however, a noticeable difference in the transition state, which is distinctly lower in diagram (b) than it is in (a). This indicates the use of a catalyst in diagram (b). The activation energy is the difference between the energy of the starting reagents and the transition state—a maximum on the reaction coordinate diagram. The reagents are at 6 kJ and the transition state is at 20 kJ, so the activation energy can be calculated as follows:

$$E_a = 20\ \text{kJ} - 6\ \text{kJ} = 14\ \text{kJ} \tag{11.5.1}$$

Exercise 11.5.1

Determine which of the two diagrams here (both for the same reaction) involves a catalyst, and identify the activation energy for the catalyzed reaction:

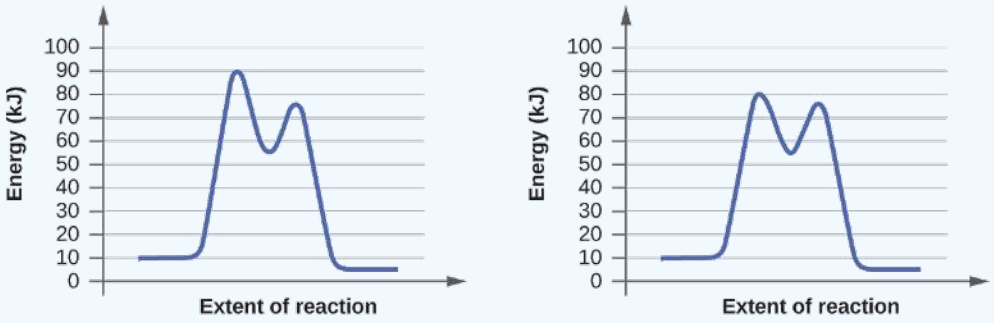

In this figure, two graphs are shown. The x-axes are labeled, “Extent of reaction,” and the y-axes are labeledc “Energy (k J).” The y-axes are marked off from 0 to 100 at intervals of 10. In a, a blue curve is shown. It begins with a horizontal segment at about 10. The curve then rises sharply near the middle to reach a maximum of about 91, then sharply falls to about 52, again rises sharply to about 73 and falls to another horizontal segment at about 5. In b, the curve begins and ends similarly, but the first peak reaches about 81, drops to about 55, then rises to about 77 before falling to the horizontal region at about 5.

Answer

Diagram (b) is a catalyzed reaction with an activation energy of about 70 kJ.

Homogeneous Catalysts

A homogeneous catalyst is present in the same phase as the reactants. It interacts with a reactant to form an intermediate substance, which then decomposes or reacts with another reactant in one or more steps to regenerate the original catalyst and form product. As an important illustration of homogeneous catalysis, consider the earth’s ozone layer. Ozone in the upper atmosphere, which protects the earth from ultraviolet radiation, is formed when oxygen molecules absorb ultraviolet light and undergo the reaction:

$$3\,O_2(g) \xrightarrow{h\nu} 2\,O_3(g) \tag{11.5.2}$$

Ozone is a relatively unstable molecule that decomposes to yield diatomic oxygen by the reverse of this equation. This decomposition reaction is consistent with the following mechanism:

$$\begin{aligned} O_3 &\longrightarrow O_2 + O \\ O + O_3 &\longrightarrow 2\,O_2 \end{aligned} \tag{11.5.3}$$

The presence of nitric oxide, NO, influences the rate of decomposition of ozone. Nitric oxide acts as a catalyst in the following mechanism:

$$\begin{aligned} NO(g) + O_3(g) &\longrightarrow NO_2(g) + O_2(g) \\ O_3(g) &\longrightarrow O_2(g) + O(g) \\ NO_2(g) + O(g) &\longrightarrow NO(g) + O_2(g) \end{aligned} \tag{11.5.4}$$

The overall chemical change for the catalyzed mechanism is the same as:

$$2\,O_3(g) \longrightarrow 3\,O_2(g) \tag{11.5.5}$$

The nitric oxide reacts and is regenerated in these reactions. It is not permanently used up; thus, it acts as a catalyst. The rate of decomposition of ozone is greater in the presence of nitric oxide because of the catalytic activity of NO. Certain compounds that contain chlorine also catalyze the decomposition of ozone.

Mario J. Molina

The 1995 Nobel Prize in Chemistry was shared by Paul J. Crutzen, Mario J. Molina (Figure **11.5.3**), and F. Sherwood Rowland "for their work in atmospheric chemistry, particularly concerning the formation and decomposition of ozone." Molina, a Mexican citizen, carried out the majority of his work at the Massachusetts Institute of Technology (MIT).



(a) (b)

Figure **11.5.3**: (a) Mexican chemist Mario Molina (1943 –) shared the Nobel Prize in Chemistry in 1995 for his research on (b) the Antarctic ozone hole. (credit a: courtesy of Mario Molina; credit b: modification of work by NASA)

A photograph is shown of Mario Molina. To the right of the photo, an image of Earth's southern hemisphere is shown with a central circular region in purple with a radius of about half that of the entire hemisphere. Just outside this region is a narrow royal blue band, followed by an outer thin turquoise blue band. The majority of the outermost region is green. Two small bands of yellow are present in the lower regions of the image.

In 1974, Molina and Rowland published a paper in the journal *Nature* (one of the major peer-reviewed publications in the field of science) detailing the threat of chlorofluorocarbon gases to the stability of the ozone layer in earth's upper atmosphere. The ozone layer protects earth from solar radiation by absorbing ultraviolet light. As chemical reactions deplete the amount of ozone in the upper atmosphere, a measurable "hole" forms above Antarctica, and an increase in the amount of solar ultraviolet radiation— strongly linked to the prevalence of skin cancers—reaches earth's surface. The work of Molina and Rowland was instrumental in the adoption of the Montreal Protocol, an international treaty signed in 1987 that successfully began phasing out production of chemicals linked to ozone destruction.

Molina and Rowland demonstrated that chlorine atoms from human-made chemicals can catalyze ozone destruction in a process similar to that by which NO accelerates the depletion of ozone. Chlorine atoms are generated when chlorocarbons or chlorofluorocarbons—once widely used as refrigerants and propellants—are photochemically decomposed by ultraviolet light or react with hydroxyl radicals. A sample mechanism is shown here using methyl chloride:

\[\ce{CH3Cl + OH ⟶ Cl + other\: products} \nonumber \]

Chlorine radicals break down ozone and are regenerated by the following catalytic cycle:

$$\mathrm{Cl + O_3 \longrightarrow ClO + O_2}$$
$$\mathrm{ClO + O \longrightarrow Cl + O_2}$$
$$\mathrm{\textbf{overall Reaction: } O_3 + O \longrightarrow 2\,O_2}$$

A single monatomic chlorine can break down thousands of ozone molecules. Luckily, the majority of atmospheric chlorine exists as the catalytically inactive forms Cl_2 and $ClONO_2$.

Glucose-6-Phosphate Dehydrogenase Deficiency

Enzymes in the human body act as catalysts for important chemical reactions in cellular metabolism. As such, a deficiency of a particular enzyme can translate to a life-threatening disease. G6PD (glucose-6-phosphate dehydrogenase) deficiency, a genetic condition that results in a shortage of the enzyme glucose-6-phosphate dehydrogenase, is the most common enzyme deficiency in humans. This enzyme, shown in Figure **11.5.4**, is the rate-limiting enzyme for the metabolic pathway that supplies NADPH to cells (FIgure **11.5.5**).

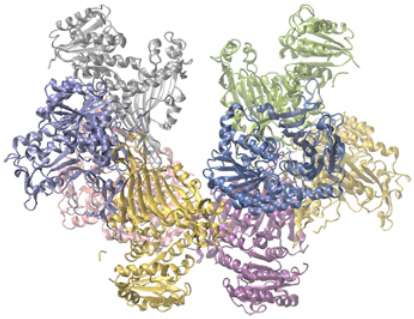

Figure **11.5.4:** Glucose-6-phosphate dehydrogenase is a rate-limiting enzyme for the metabolic pathway that supplies NADPH to cells.

A colorful model of the Glucose-6-phosphate dehydrogenase structure is shown. The molecule has two distinct lobes which are filled with spiraled ribbon-like regions of yellow, lavender, blue, silver, green, and pink.

A disruption in this pathway can lead to reduced glutathione in red blood cells; once all glutathione is consumed, enzymes and other proteins such as hemoglobin are susceptible to damage. For example, hemoglobin can be metabolized to bilirubin, which leads to jaundice, a condition that can become severe. People who suffer from G6PD deficiency must avoid certain foods and medicines containing chemicals that can trigger damage their glutathione-deficient red blood cells.

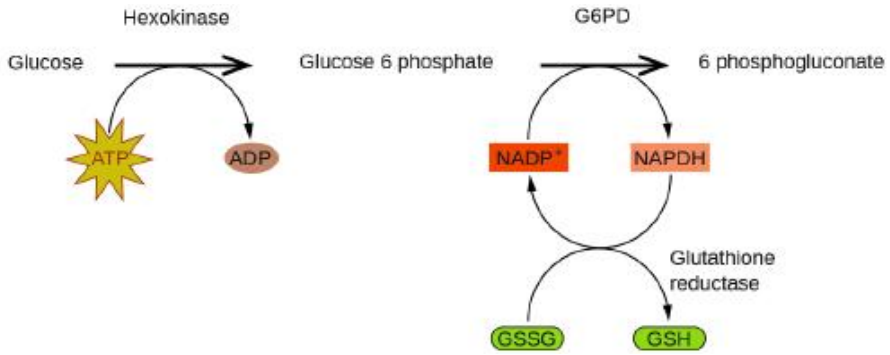

Figure **11.5.5**: In the mechanism for the pentose phosphate pathway, G6PD catalyzes the reaction that regulates NAPDH, a co-enzyme that regulates glutathione, an antioxidant that protects red blood cells and other cells from oxidative damage.

A reaction mechanism is diagrammed in this figure. At the left, the name Glucose is followed by a horizontal, right pointing arrow, labeled, “Hexokinase.” Below this arrow and to the left is a yellow star shape labeled, “A T P.” A curved arrow extends from this shape to the right pointing arrow, and down to the right to a small brown oval labeled, “A D P.” To the right of the horizontal arrow is the name Glucose 6 phosphate, which is followed by another horizontal, right pointing arrow which is labeled, “G 6 P D.” A small orange rectangle below and left of this arrow is labeled “N A D P superscript plus.” A curved arrow extends from this shape to the right pointing arrow, and down to the right to a small salmon-colored rectangle labeled “N A P D H.” A curved arrow extends from this shape below and to the left, back to the orange rectangle labeled, “N A D P superscript plus.” Another curved arrow extends from a green oval labeled “G S S G” below the orange rectangle, up to the arrow curving back to the orange rectangle. This last curved arrow continues on to the lower right to a second green oval labeled, “G S H.” The end of this curved arrow is labeled, “Glutathione reductase.” To the right of the rightmost horizontal arrow appears the name 6 phosphogluconate.

Heterogeneous Catalysts

A heterogeneous catalyst is a catalyst that is present in a different phase (usually a solid) than the reactants. Such catalysts generally function by furnishing an active surface upon which a reaction can occur. Gas and liquid phase reactions catalyzed by heterogeneous catalysts occur on the surface of the catalyst rather than within the gas or liquid phase.

Heterogeneous catalysis has at least four steps:

1. Adsorption of the reactant onto the surface of the catalyst
2. Activation of the adsorbed reactant
3. Reaction of the adsorbed reactant
4. Diffusion of the product from the surface into the gas or liquid phase (desorption).

Any one of these steps may be slow and thus may serve as the rate determining step. In general, however, in the presence of the catalyst, the overall rate of the reaction is faster than it would be if the reactants were in the gas or liquid phase.

Figure 11.5.6 illustrates the steps that chemists believe to occur in the reaction of compounds containing a carbon–carbon double bond with hydrogen on a nickel catalyst. Nickel is the catalyst used in the hydrogenation of polyunsaturated fats and oils (which contain several carbon–carbon double bonds) to produce saturated fats and oils (which contain only carbon–carbon single bonds).

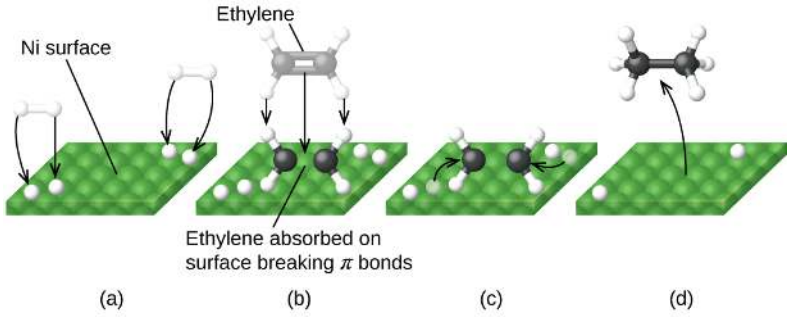

Figure 11.5.6: There are four steps in the catalysis of the reaction $C_2H_4 + H_2 \longrightarrow C_2H_6$ *by nickel. (a) Hydrogen is adsorbed on the surface, breaking the H–H bonds and forming Ni–H bonds. (b) Ethylene is adsorbed on the surface, breaking the π-bond and forming Ni–C bonds. (c) Atoms diffuse across the surface and form new C–H bonds when they collide. (d)* C_2H_6 *molecules escape from the nickel surface, since they are not strongly attracted to nickel.*

In this figure, four diagrams labeled a through d are shown. In each, a green square surface is shown in perspective to provide a three-dimensional appearance. In a, the label “N i surface” is placed above with a line segment extending to the green square. At the lower left and upper right, pairs of white spheres bonded tougher together appear as well as white spheres on the green surface. Black arrows are drawn from each of the white spheres above the surface to the white sphere on the green surface. In b, the white spheres are still present on the green surface. Near the center of this surface is a molecule with two central black spheres with a double bond indicated by two horizontal black rods between them. Above and below to the left and right, a total of four white spheres are connected to the black spheres with white rods. A line segment extends from this structure to the label, “Ethylene absorbed on surface breaking pi bonds.” Just above this is a nearly identical structure greyed out with three downward pointing arrows to the black and white structure to indicate downward motion. The label “Ethylene” at the top of the diagram is connected to the greyed out structure with a line segment. In c, the diagram is very similar to b except that the greyed out structure and labels are gone and one of the white spheres near the black and white structure in each pair on the green surface is greyed out. Arrows point from the greyed out white spheres to the double bond between the two black spheres. In d, only a single white sphere remains from each pair in the green surface. A curved arrow points from the middle of the green surface to a model above with two central black spheres with a single black rod indicating a single bond between them. Each of the black rods has three small white spheres bonded as indicated by white rods between the black spheres and the small white spheres. The four bonds around each black sphere are evenly distributed about the black spheres.

Other significant industrial processes that involve the use of heterogeneous catalysts include the preparation of sulfuric acid, the preparation of ammonia, the oxidation of ammonia to nitric acid, and the synthesis of methanol, CH_3OH. Heterogeneous catalysts are also used in the catalytic converters found on most gasoline-powered automobiles (Figure 11.5.7).

Automobile Catalytic Converters

Scientists developed catalytic converters to reduce the amount of toxic emissions produced by burning gasoline in internal combustion engines. Catalytic converters take advantage of all five factors that affect the speed of chemical reactions to ensure that exhaust emissions are as safe as possible.

By utilizing a carefully selected blend of catalytically active metals, it is possible to effect complete combustion of all carbon-containing compounds to carbon dioxide while also reducing the output of nitrogen oxides. This is particularly impressive when we consider that one step involves adding more oxygen to the molecule and the other involves removing the oxygen (Figure 11.5.6).

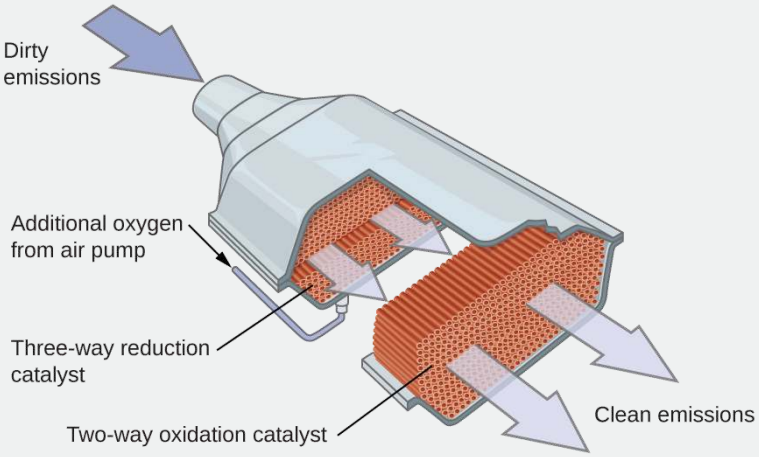

Figure 11.5.6: A catalytic converter allows for the combustion of all carbon-containing compounds to carbon dioxide, while at the same time reducing the output of nitrogen oxide and other pollutants in emissions from gasoline-burning engines.

An image is shown of a catalytic converter. At the upper left, a blue arrow pointing into a pipe that enters a larger, widened chamber is labeled, “Dirty emissions.” A small black arrow that points to the lower right is positioned along the upper left side of the widened region. This arrow is labeled, “Additional oxygen from air pump.” The image shows the converter with the upper surface removed, exposing a red-brown interior. The portion of the converter closest to the dirty emissions inlet shows small, round components in an interior layer. This layer is labeled “Three-way reduction catalyst.” The middle region shows closely packed small brown rods that are aligned parallel to the dirty emissions inlet pipe. The final quarter of the interior of the catalytic converter again shows a layer of closely packed small red brown circles. Two large light grey arrows extend from this layer to the open region at the lower right of the image to the label “Clean emissions.”

Most modern, three-way catalytic converters possess a surface impregnated with a platinum-rhodium catalyst, which catalyzes the conversion nitric oxide into dinitrogen and oxygen as well as the conversion of carbon monoxide and hydrocarbons such as octane into carbon dioxide and water vapor:

$$2\,NO_2(g) \longrightarrow N_2(g) + 2\,O_2(g)$$
$$[5pt]2\,CO(g) + O_2(g) \longrightarrow 2\,CO_2(g)$$
$$[5pt]2_8\,CH_{18}(g) + 25\,O_2(g) \longrightarrow 16\,CO_2(g) + 18\,H_2O(g)$$

In order to be as efficient as possible, most catalytic converters are preheated by an electric heater. This ensures that the metals in the catalyst are fully active even before the automobile exhaust is hot enough to maintain appropriate reaction temperatures.

Enzyme Structure and Function

The study of enzymes is an important interconnection between biology and chemistry. Enzymes are usually proteins (polypeptides) that help to control the rate of chemical reactions between biologically important compounds, particularly those that are involved in cellular metabolism. Different classes of enzymes perform a variety of functions, as shown in Table 11.5.1.

ATP hydrolysis.”" data-quail-id="131" data-mt-width="1016">

Table 11.5.1: Classes of Enzymes and Their Functions

Class	Function
oxidoreductases	redox reactions
transferases	transfer of functional groups
hydrolases	hydrolysis reactions
lyases	group elimination to form double bonds
isomerases	isomerization
ligases	bond formation with ATP hydrolysis

Enzyme molecules possess an active site, a part of the molecule with a shape that allows it to bond to a specific substrate (a reactant molecule), forming an enzyme-substrate complex as a reaction intermediate. There are two models that attempt to explain how this active site works. The most simplistic model is referred to as the lock-and-key hypothesis, which suggests that the molecular shapes of the active site and substrate are complementary, fitting together like a key in a lock. The induced fit hypothesis, on the other hand, suggests that the enzyme molecule is flexible and changes shape to accommodate a bond with the substrate. This is not to suggest that an enzyme's active site is completely malleable, however. Both the lock-and-key model and the induced fit model account for the fact that enzymes can only bind with specific substrates, since in general a particular enzyme only catalyzes a particular reaction (Figure 11.5.7).

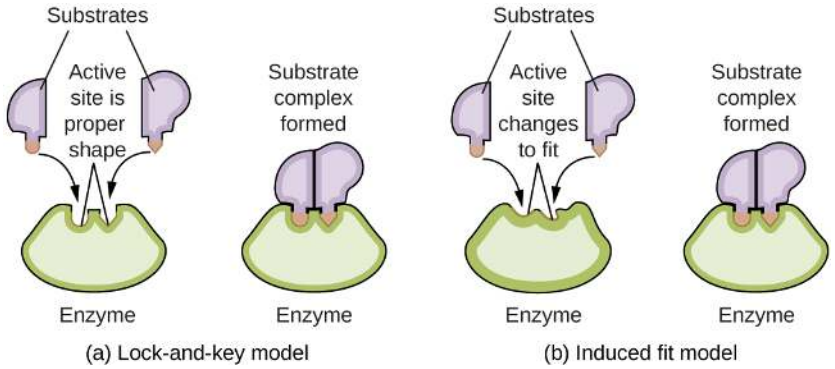

Figure 11.5.7: (a) According to the lock-and-key model, the shape of an enzyme's active site is a perfect fit for the substrate. (b) According to the induced fit model, the active site is somewhat flexible, and can change shape in order to bond with the substrate.

A diagram is shown of two possible interactions of an enzyme and a substrate. In a, which is labeled "Lock-and-key," two diagrams are shown. The first shows a green wedge-like shape with two small depressions in the upper surface of similar size, but the depression on the left has a curved shape, and the depression on the right has a pointed shape. This green shape is labeled "Enzyme." Just above this shape are two smaller, irregular, lavender shapes each with a projection from its lower surface. The lavender shape on the left has a curved projection which matches the shape of the depression on the left in the green shape below. This projection is shaded orange and has a curved arrow extending from in to the matching depression in the green shape below. Similarly, the lavender shape on the right has a projection with a pointed tip which matches the shape of the depression on the right in the green shape below. This projection is shaded orange and has a curved arrow extending from in to the matching depression in the green shape below. Two line segments extend from the depressions in the green shape to form an inverted V shape above the depressions. Above this and between the lavender shapes is the label, "Active site is proper shape." The label "Substrates" is at the very top of the diagram with line segments extending to the two lavender shapes. To the right of this diagram is a second diagram showing the lavender shapes positioned next to each other, fit snugly into the depressions in the green shape, which is labeled "Enzyme." Above this diagram is the label, "Substrate complex formed." In b, which is labeled "Induced fit," two diagrams are shown. The first shows a green wedge-like shape with two small depressions in the upper surface of similar size, but irregular shape. This green shape is labeled "Enzyme." Just above this shape are two smaller irregular lavender shapes each with a projection from its lower surface. The lavender shape on the left has a curved projection. This projection is shaded orange and has a curved arrow extending from it to the irregular depression just below it in the green shape below. Similarly, the lavender shape on the right has a projection with a pointed tip. This projection is shaded orange and has a curved arrow extending from it to the irregular depression just below it in the green shape below. Two line segments extend from the depressions in the green shape to form an inverted V shape above the depressions. Above this and between the lavender shapes is the label, "Active site changes to fit." The label, "Substrates" is at the very top of the diagram with line segments extending to the two lavender shapes. To the right of this diagram is a second diagram showing the purple shapes positioned next to each other, fit snugly into the depressions in the green shape, which is labeled "Enzyme." Above this diagram is the label "Substrate complex formed." The projections from the lavender shapes match the depression shapes in the green shape, resulting in a proper fit.

Summary

Catalysts affect the rate of a chemical reaction by altering its mechanism to provide a lower activation energy. Catalysts can be homogenous (in the same phase as the reactants) or heterogeneous (a different phase than the reactants).

Footnotes

1. "The Nobel Prize in Chemistry 1995," Nobel Prize.org, accessed February 18, 2015, Nobel Prizes Chemistry [www.nobelprize.org].

Glossary

heterogeneous catalyst

catalyst present in a different phase from the reactants, furnishing a surface at which a reaction can occur

homogeneous catalyst

catalyst present in the same phase as the reactants

This page titled 11.5: Catalysis is shared under a CC BY license and was authored, remixed, and/or curated by OpenStax.

- **12.8: Catalysis** by OpenStax is licensed CC BY 4.0. Original source: https://openstax.org/details/books/chemistry-2e.

CHAPTER OVERVIEW

12: Fundamental Equilibrium Concepts

A general chemistry Libretexts Textmap organized around the textbook
General Chemistry -Atoms First
By OpenStax

In this chapter, you will learn how to predict the position of the balance and the yield of a product of a reaction under specific conditions, how to change a reaction's conditions to increase or reduce yield, and how to evaluate an equilibrium system's reaction to disturbances.

Topic hierarchy

12.1: Prelude to Equilibrium
12.2: Chemical Equilibria
12.3: Equilibrium Constants
12.4: Shifting Equilibria: Le Châtelier’s Principle
12.5: Equilibrium Calculations
12.6: Fundamental Equilibrium Concepts (Exercises)

Contributors

- Paul Flowers (University of North Carolina - Pembroke), Klaus Theopold (University of Delaware) and Richard Langley (Stephen F. Austin State University) with contributing authors. Textbook content produced by OpenStax College is licensed under a Creative Commons Attribution License 4.0 license. Download for free at http://cnx.org/contents/85abf193-2bd...a7ac8df6@9.110).

This page titled 12: Fundamental Equilibrium Concepts is shared under a CC BY license and was authored, remixed, and/or curated by OpenStax.

12.1: Prelude to Equilibrium

Imagine a beach populated with sunbathers and swimmers. As those basking in the sun get too hot and want to cool off, they head into the surf to swim. As the swimmers tire, they head to the beach to rest. If these two rates of transfer (sunbathers entering the water, swimmers leaving the water) are equal, the number of sunbathers and swimmers would be constant, or at equilibrium, although the identities of the people are constantly changing from sunbather to swimmer and back. An analogous situation occurs in chemical reactions. Reactions can occur in both directions simultaneously (reactants to products and products to reactants) and eventually reach a state of balance.

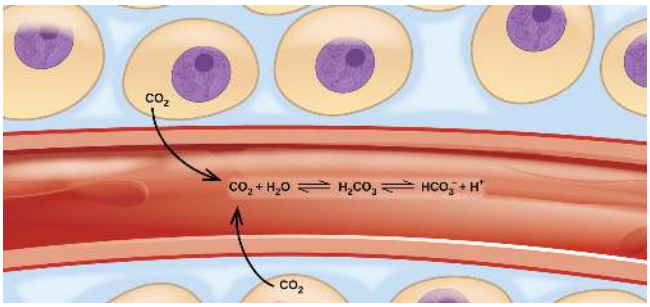

Figure **12.1.1**: Movement of carbon dioxide through tissues and blood cells involves several equilibrium reactions.

An image depicts three tan squares, lying side-by-side along the upper left corner. Two of the same squares also lie side-by-side in the lower right corner. Each square has a black dot in the center. One of the squares is labeled, “C O subscript 2,” and has a double-headed arrow pointing from it to a red tube-like structure that runs between the squares across the image from the upper right to the lower left. This arrow is labeled, “C O subscript 2 dissolved in plasma.” The red tube has two round red shapes in it, and the upper one is labeled, “C O subscript 2 carried in red blood cells.” The gaps between the squares and the red tube are colored light blue. One of the squares along the top of the image is labeled, “C O subscript 2,” and is connected by a double-headed arrow to an equation in the red tube that is labeled, “C O subscript 2, a plus sign, H subscript 2 O, right-facing arrow, H subscript 2 C O subscript 3, right-facing arrow, H C O subscript 3 superscript negative sign, plus sign, H superscript positive sign.” The compound “H C O subscript 3 superscript negative sign” is then connected by a double-headed arrow to the space in the red tube and is labeled, “H C O subscript 3 superscript negative sign dissolved in plasma as carbonic acid.”

These balanced two-way reactions occur all around and even in us. For example, they occur in our blood, where the reaction between carbon dioxide and water forms carbonic acid (HCO_3^-) (Figure **12.1.1**). Human physiology is adapted to the amount of ionized products produced by this reaction (HCO_3^- and H^+). In this chapter, you will learn how to predict the position of the balance and the yield of a product of a reaction under specific conditions, how to change a reaction's conditions to increase or reduce yield, and how to evaluate an equilibrium system's reaction to disturbances.

This page titled 12.1: Prelude to Equilibrium is shared under a CC BY license and was authored, remixed, and/or curated by OpenStax.

- **13.1: Prelude to Equilibrium** by OpenStax is licensed CC BY 4.0. Original source: https://openstax.org/details/books/chemistry-2e.

12.2: Chemical Equilibria

Learning Objectives

- Describe the nature of equilibrium systems
- Explain the dynamic nature of a chemical equilibrium

A chemical reaction is usually written in a way that suggests it proceeds in one direction, the direction in which we read, but all chemical reactions are reversible, and both the forward and reverse reaction occur to one degree or another depending on conditions. In a chemical equilibrium, the forward and reverse reactions occur at equal rates, and the concentrations of products and reactants remain constant. If we run a reaction in a closed system so that the products cannot escape, we often find the reaction does not give a 100% yield of products. Instead, some reactants remain after the concentrations stop changing. At this point, when there is no further change in concentrations of reactants and products, we say the reaction is at equilibrium. A mixture of reactants and products is found at equilibrium.

For example, when we place a sample of dinitrogen tetroxide (N_2O_4, a colorless gas) in a glass tube, it forms nitrogen dioxide (NO_2, a brown gas) by the reaction

$$N_2O_4(g) \rightleftharpoons 2NO_2(g) \tag{12.2.1}$$

The color becomes darker as N_2O_4 is converted to NO_2. When the system reaches equilibrium, both N_2O_4 and NO_2 are present (Figure 12.2.1).

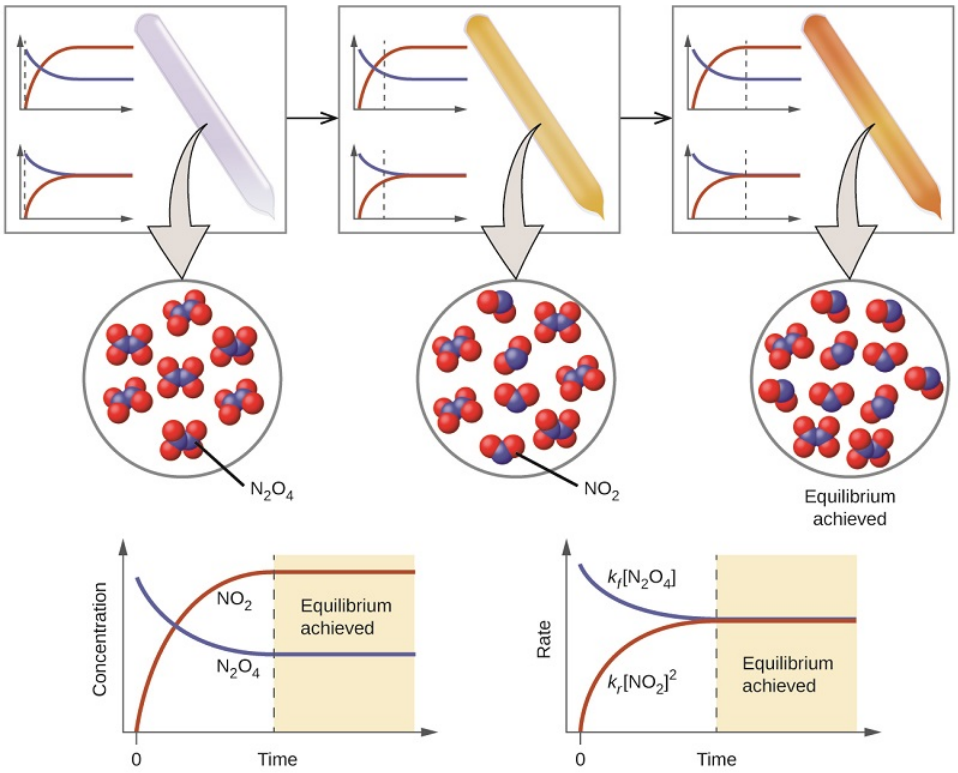

Figure **12.2.1**: A mixture of NO_2 and N_2O_4 moves toward equilibrium. Colorless N_2O_4 reacts to form brown NO_2. As the reaction proceeds toward equilibrium, the color of the mixture darkens due to the increasing concentration of NO_2.

A three-part diagram is shown. At the top of the diagram, three beakers are shown, and each one contains a sealed tube. The tube in the left beaker is full of a colorless gas which is connected to a zoom-in view of the particles in the tube by a downward-facing arrow. This particle view shows seven particles, each composed of two connected blue spheres. Each blue sphere is connected to two red spheres. The tube in the middle beaker is full of a light brown gas which is connected to a zoom-in view of the particles in the tube by a downward-facing arrow. This particle view shows nine particles, five of which are composed of two connected blue spheres. Each blue sphere is connected to two red spheres. The remaining four are composed of two red spheres connected to a blue sphere. The tube in the right beaker is full of a brown gas which is connected to a zoom-in view of the particles in the tube by a downward-facing arrow. This particle view shows eleven particles, three of which are composed of two connected blue spheres. Each blue sphere is connected to two red spheres. The remaining eight are composed of two red spheres connected to a blue sphere. At the bottom of the image are two graphs. The left graph has a y-axis labeled, “Concentration,” and an x-axis labeled, “Time.” A red line labeled, “N O subscript 2,” begins in the bottom left corner of the graph at a point labeled, “0,” and rises near the highest point on the y-axis before it levels off and becomes horizontal. A blue line labeled, “N subscript 2 O subscript 4,” begins near the highest point on the y-axis and drops below the midpoint of the y-axis before leveling off. The right graph has a y-axis labeled, “Rate,” and an x-axis labeled, “Time.” A red line labeled, “k subscript f, [N subscript 2 O subscript 4],” begins in the bottom left corner of the graph at a point labeled, “0,” and rises near the middle of the y-axis before it levels off and becomes horizontal. A blue line labeled, “k subscript f, [N O subscript 2] superscript 2,” begins near the highest point on the y-axis and drops to the same point on the y-axis as the red line before leveling off. The point where both lines become horizontal is labeled, “Equilibrium achieved.”

The formation of NO_2 from N_2O_4 is a reversible reaction, which is identified by the equilibrium arrow (⇌). All reactions are reversible, but many reactions, for all practical purposes, proceed in one direction until the reactants are exhausted and will reverse only under certain conditions. Such reactions are often depicted with a one-way arrow from reactants to products. Many other reactions, such as the formation of NO_2 from N_2O_4, are reversible under more easily obtainable conditions and, therefore, are named as such. In a reversible reaction, the reactants can combine to form products and the products can react to form the reactants. Thus, not only can N_2O_4 decompose to form NO_2, but the NO_2 produced can react to form N_2O_4. As soon as the forward reaction produces any NO_2, the reverse reaction begins and NO_2 starts to react to form N_2O_4. At equilibrium, the concentrations of N_2O_4 and NO_2 no longer change because the rate of formation of NO_2 is exactly equal to the rate of consumption of NO_2, and the rate of formation of N_2O_4 is exactly equal to the rate of consumption of N_2O_4. *Chemical equilibrium is a dynamic process*: As with the swimmers and the sunbathers, the numbers of each remain constant, yet there is a flux back and forth between them (Figure **12.2.2**).

Figure 12.2.2: These jugglers provide an illustration of dynamic equilibrium. Each throws clubs to the other at the same rate at which he receives clubs from that person. Because clubs are thrown continuously in both directions, the number of clubs moving in each direction is constant, and the number of clubs each juggler has at a given time remains (roughly) constant.

In a chemical equilibrium, the forward and reverse reactions do not stop, rather they continue to occur at the same rate, leading to constant concentrations of the reactants and the products. Plots showing how the reaction rates and concentrations change with respect to time are shown in Figure 12.2.1.

We can detect a state of equilibrium because the concentrations of reactants and products do not appear to change. However, it is important that we verify that the absence of change is due to equilibrium and not to a reaction rate that is so slow that changes in concentration are difficult to detect.

We use a double arrow when writing an equation for a reversible reaction. Such a reaction may or may not be at equilibrium. For example, Figure 12.2.1 shows the reaction:

$$\mathrm{N_2O_4\,(g)} \rightleftharpoons \mathrm{2\,NO_2\,(g)} \tag{12.2.2}$$

When we wish to speak about one particular component of a reversible reaction, we use a single arrow. For example, in the equilibrium shown in Figure 12.2.1, the rate of the forward reaction

$$\mathrm{2\,NO_2\,(g)} \rightarrow \mathrm{N_2O_4\,(g)} \tag{12.2.3}$$

is equal to the rate of the backward reaction

$$\mathrm{N_2O_4\,(g)} \rightarrow \mathrm{2\,NO_2\,(g)} \tag{12.2.4}$$

Equilibrium and Soft Drinks

The connection between chemistry and carbonated soft drinks goes back to 1767, when Joseph Priestley (1733–1804; mostly known today for his role in the discovery and identification of oxygen) discovered a method of infusing water with carbon dioxide to make carbonated water. In 1772, Priestly published a paper entitled “Impregnating Water with Fixed Air.” The paper describes dripping oil of vitriol (today we call this sulfuric acid, but what a great way to describe sulfuric acid: “oil of vitriol” literally means “liquid nastiness”) onto chalk (calcium carbonate). The resulting CO_2 falls into the container of water beneath the vessel in which the initial reaction takes place; agitation helps the gaseous CO_2 mix into the liquid water.

$$\mathrm{H_2SO_4\,(l) + CaCO_3\,(s)} \rightarrow \mathrm{CO_2\,(g) + H_2O\,(l) + CaSO_4\,(aq)}$$

Carbon dioxide is slightly soluble in water. There is an equilibrium reaction that occurs as the carbon dioxide reacts with the water to form carbonic acid (H_2CO_3). Since carbonic acid is a weak acid, it can dissociate into protons (H^+) and hydrogen carbonate ions (HCO_3^-).

$$\mathrm{CO_2\,(aq) + H_2O\,(l)} \rightleftharpoons \mathrm{H_2CO_3\,(aq)} \rightleftharpoons \mathrm{HCO_3^-\,(aq) + H^+\,(aq)}$$

Today, CO_2 can be pressurized into soft drinks, establishing the equilibrium shown above. Once you open the beverage container, however, a cascade of equilibrium shifts occurs. First, the CO_2 gas in the air space on top of the bottle escapes, causing the equilibrium between gas-phase CO_2 and dissolved or aqueous CO_2 to shift, lowering the concentration of CO_2 in the soft drink. Less CO_2 dissolved in the liquid leads to carbonic acid decomposing to dissolved CO_2 and H_2O. The lowered

carbonic acid concentration causes a shift of the final equilibrium. As long as the soft drink is in an open container, the CO_2 bubbles up out of the beverage, releasing the gas into the air (Figure 12.2.3). With the lid off the bottle, the CO_2 reactions are no longer at equilibrium and will continue until no more of the reactants remain. This results in a soft drink with a much lowered CO_2 concentration, often referred to as "flat."

Figure 12.2.3: When a soft drink is opened, several equilibrium shifts occur. (credit: modification of work by "D Coetzee"/Flickr)

A bottle of soda sitting on the ground is shown with a large amount of fizz-filled liquid spewing out of the top.

Sublimation of Bromine

Let us consider the evaporation of bromine as a second example of a system at equilibrium.

$$Br_2(l) \rightleftharpoons Br_2(g)$$

An equilibrium can be established for a physical change—like this liquid to gas transition—as well as for a chemical reaction. Figure 12.2.4 shows a sample of liquid bromine at equilibrium with bromine vapor in a closed container. When we pour liquid bromine into an empty bottle in which there is no bromine vapor, some liquid evaporates, the amount of liquid decreases, and the amount of vapor increases. If we cap the bottle so no vapor escapes, the amount of liquid and vapor will eventually stop changing and an equilibrium between the liquid and the vapor will be established. If the bottle were not capped, the bromine vapor would escape and no equilibrium would be reached.

Figure 12.2.4: An equilibrium is pictured between liquid bromine, $Br_2(l)$, the dark liquid, and bromine vapor, $Br_2(g)$, the orange gas. Because the container is sealed, bromine vapor cannot escape and equilibrium is maintained. (credit: Bromine [images-of-elements.com]).

A glass container is shown that is filled with an orange-brown gas and a small amount of dark orange liquid.

Summary

A reaction is at equilibrium when the amounts of reactants or products no longer change. Chemical equilibrium is a dynamic process, meaning the rate of formation of products by the forward reaction is equal to the rate at which the products re-form reactants by the reverse reaction.

Glossary

equilibrium

in chemical reactions, the state in which the conversion of reactants into products and the conversion of products back into reactants occur simultaneously at the same rate; state of balance

reversible reaction

chemical reaction that can proceed in both the forward and reverse directions under given conditions

---

This page titled 12.2: Chemical Equilibria is shared under a CC BY license and was authored, remixed, and/or curated by OpenStax.

- **13.2: Chemical Equilibria** by OpenStax is licensed CC BY 4.0. Original source: https://openstax.org/details/books/chemistry-2e.

12.3: Equilibrium Constants

Learning Objectives

- Derive reaction quotients from chemical equations representing homogeneous and heterogeneous reactions
- Calculate values of reaction quotients and equilibrium constants, using concentrations and pressures
- Relate the magnitude of an equilibrium constant to properties of the chemical system

Now that we have a symbol (⇌) to designate reversible reactions, we will need a way to express mathematically how the amounts of reactants and products affect the equilibrium of the system. A general equation for a reversible reaction may be written as follows:

$$mA + nB + \rightleftharpoons xC + yD \tag{12.3.1}$$

We can write the reaction quotient (Q) for this equation. When evaluated using concentrations, it is called Q_c. We use brackets to indicate molar concentrations of reactants and products.

$$Q_c = \frac{[C]^x[D]^y}{[A]^m[B]^n} \tag{12.3.2}$$

The reaction quotient is equal to the molar concentrations of the products of the chemical equation (multiplied together) over the reactants (also multiplied together), with each concentration raised to the power of the coefficient of that substance in the balanced chemical equation. For example, the reaction quotient for the reversible reaction

$$2\,NO_{2(g)} \rightleftharpoons N_2O_{4(g)} \tag{12.3.3}$$

is given by this expression:

$$Q_c = \frac{[N_2O_4]}{[NO_2]^2} \tag{12.3.4}$$

Example 12.3.1: Writing Reaction Quotient Expressions

Write the expression for the reaction quotient for each of the following reactions:

a. $3\,O_{2(g)} \rightleftharpoons 2\,O_{3(g)}$
b. $N_{2(g)} + 3\,H_{2(g)} \rightleftharpoons 2\,NH_{3(g)}$
c. $4\,NH_{3(g)} + 7\,O_{2(g)} \rightleftharpoons 4\,NO_{2(g)} + 6\,H_2O_{(g)}$

Solution

a. $Q_c = \frac{[O_3]^2}{[O_2]^3}$
b. $Q_c = \frac{[NH_3]^2}{[N_2][H_2]^3}$
c. $Q_c = \frac{[NO_2]^4[H_2O]^6}{[NH_3]^4[O_2]^7}$

Exercise 12.3.1

Write the expression for the reaction quotient for each of the following reactions:

a. $2\,SO_2(g) + O_2(g) \rightleftharpoons 2\,SO_3(g)$
b. $C_4H_8(g) \rightleftharpoons 2\,C_2H_4(g)$
c. $2\,C_4H_{10}(g) + 13\,O_2(g) \rightleftharpoons 8\,CO_2(g) + 10\,H_2O(g)$

Answer a

$$Q_c = \frac{[SO_3]^2}{[SO_2]^2[O_2]}$$

Answer b

$$Q_c = \frac{[C_2H_4]^2}{[C_4H_8]}$$

Answer c

$$Q_c = \frac{[CO_2]^8[H_2O]^{10}}{[C_4H_{10}]^2[O_2]^{13}}$$

The numeric value of Q_c for a given reaction varies; it depends on the concentrations of products and reactants present at the time when Q_c is determined. When pure reactants are mixed, Q_c is initially zero because there are no products present at that point. As the reaction proceeds, the value of Q_c increases as the concentrations of the products increase and the concentrations of the reactants simultaneously decrease (Figure 12.3.1). When the reaction reaches equilibrium, the value of the reaction quotient no longer changes because the concentrations no longer change.

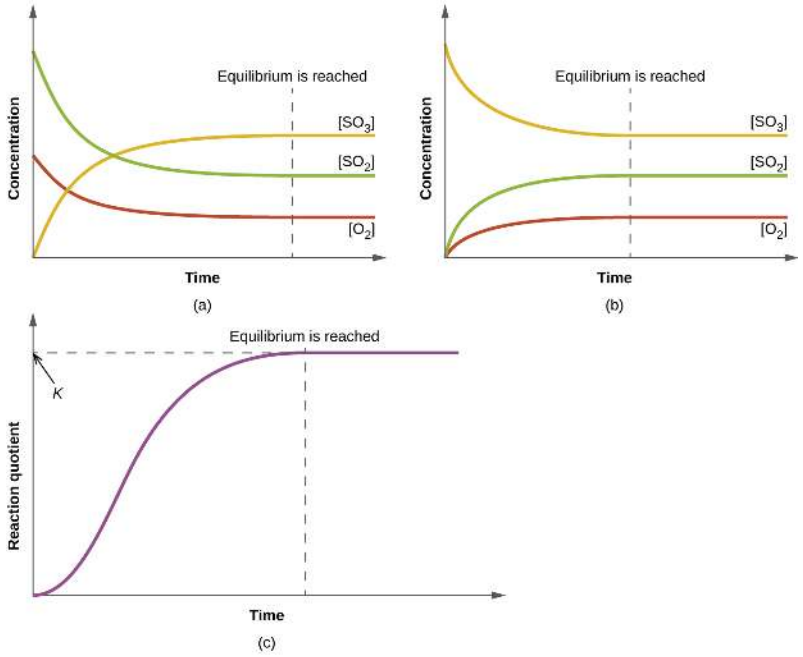

Figure 12.3.1: (a) The change in the concentrations of reactants and products is depicted as the $2SO_2(g) + O_2(g) \rightleftharpoons 2SO_3(g)$ reaction approaches equilibrium. (b) The change in concentrations of reactants and products is depicted as the reaction $2SO_3(g) \rightleftharpoons 2SO_2(g) + O_2(g)$ approaches equilibrium. (c) The graph shows the change in the value of the reaction quotient as the reaction approaches equilibrium.

Three graphs are shown and labeled, “a,” “b,” and “c.” All three graphs have a vertical dotted line running through the middle labeled, “Equilibrium is reached.” The y-axis on graph a is labeled, “Concentration,” and the x-axis is labeled, “Time.” Three curves are plotted on graph a. The first is labeled, “[S O subscript 2];” this line starts high on the y-axis, ends midway down the y-axis, has a steep initial slope and a more gradual slope as it approaches the far right on the x-axis. The second curve on this graph is labeled, “[O subscript 2];” this line mimics the first except that it starts and ends about fifty percent lower on the y-axis. The third curve is the inverse of the first in shape and is labeled, “[S O subscript 3].” The y-axis on graph b is labeled, “Concentration,” and the x-axis is labeled, “Time.” Three curves are plotted on graph b. The first is labeled, “[S O subscript 2];” this line starts low on the y-axis, ends midway up the y-axis, has a steep initial slope and a more gradual slope as it approaches the far right on the x-axis. The second curve on this graph is labeled, “[O subscript 2];” this line mimics the first except that it ends about fifty percent lower on the y-axis. The third curve is the inverse of the first in shape and is labeled, “[S O subscript 3].” The y-axis on graph c is labeled, “Reaction Quotient,” and the x-axis is labeled, “Time.” A single curve is plotted on graph c. This curve begins at the bottom of the y-axis and rises steeply up near the top of the y-axis, then levels off into a horizontal line. The top point of this line is labeled, “k.”

When a mixture of reactants and products of a reaction reaches equilibrium at a given temperature, its reaction quotient always has the same value. This value is called the equilibrium constant (K) of the reaction at that temperature. As for the reaction quotient, when evaluated in terms of concentrations, it is noted as K_c.

That a reaction quotient always assumes the same value at equilibrium can be expressed as:

$$Q_c \text{ at equilibrium} = K_c = \frac{[C]^x[D]^y\ldots}{[A]^m[B]^n\ldots} \tag{12.3.5}$$

This equation is a mathematical statement of the law of mass action: When a reaction has attained equilibrium at a given temperature, the reaction quotient for the reaction always has the same value.

Example 12.3.2: Evaluating a Reaction Quotient

Gaseous nitrogen dioxide forms dinitrogen tetroxide according to this equation:

$$2\,NO_{2(g)} \rightleftharpoons N_2O_{4(g)}$$

When 0.10 mol NO_2 is added to a 1.0-L flask at 25 °C, the concentration changes so that at equilibrium, [NO_2] = 0.016 M and [N_2O_4] = 0.042 M.

a. What is the value of the reaction quotient before any reaction occurs?
b. What is the value of the equilibrium constant for the reaction?

Solution

a. Before any product is formed, $[NO_2] = \frac{0.10\text{ mol}}{1.0\text{ L}} = 0.10\ M$, and [$N_2O_4$] = 0 *M*. Thus,

$$Q_c = \frac{[N2O4]}{[NO2]^2} = \frac{0}{0.10^2} = 0$$

b. At equilibrium, the value of the equilibrium constant is equal to the value of the reaction quotient. At equilibrium,

$$K_c = Q_c = \frac{[N2O4]}{[NO2]^2} = \frac{0.042}{0.016^2} = 1.6 \times 10^2.$$

The equilibrium constant is 1.6×10^2.

Note that dimensional analysis would suggest the unit for this K_c value should be M^{-1}. However, it is common practice to omit units for K_c values computed as described here, since it is the magnitude of an equilibrium constant that relays useful information. As will be discussed later in this module, the rigorous approach to computing equilibrium constants uses dimensionless quantities derived from activities instead of molar concentrations, and so K_c values are truly unitless.

Exercise 12.3.2

For the reaction

$$2\,SO_2(g) + O_2(g) \rightleftharpoons 2\,SO_3(g)$$

the concentrations at equilibrium are [SO_2] = 0.90 *M*, [O_2] = 0.35 *M*, and [SO_3] = 1.1 *M*. What is the value of the equilibrium constant, K_c?

Answer

K_c = 4.3

The magnitude of an equilibrium constant is a measure of the yield of a reaction when it reaches equilibrium. A large value for K_c indicates that equilibrium is attained only after the reactants have been largely converted into products. A small value of K_c—much less than 1—indicates that equilibrium is attained when only a small proportion of the reactants have been converted into products.

Once a value of K_c is known for a reaction, it can be used to predict directional shifts when compared to the value of Q_c. A system that is not at equilibrium will proceed in the direction that establishes equilibrium. The data in Figure **12.3.2** illustrate this. When heated to a consistent temperature, 800 °C, different starting mixtures of CO, H_2O, CO_2, and H_2 react to reach compositions adhering to the same equilibrium (the value of Q_c changes until it equals the value of K_c). This value is 0.640, the equilibrium constant for the reaction under these conditions.

$$CO(g) + H_2O(g) \rightleftharpoons CO_2(g) + H_2(g) \quad K_c = 0.640 \quad T = 800°C \tag{12.3.6}$$

It is important to recognize that an equilibrium can be established starting either from reactants or from products, or from a mixture of both. For example, equilibrium was established from Mixture 2 in Figure 12.3.2 when the products of the reaction were heated in a closed container. In fact, one technique used to determine whether a reaction is truly at equilibrium is to approach equilibrium starting with reactants in one experiment and starting with products in another. If the same value of the reaction quotient is observed when the concentrations stop changing in both experiments, then we may be certain that the system has reached equilibrium.

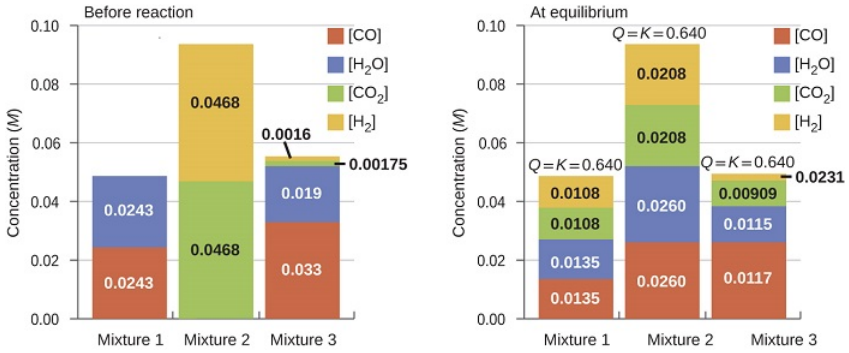

Figure 12.3.2: Concentrations of three mixtures are shown before and after reaching equilibrium at 800 °C for the so-called water gas shift reaction (Equation 12.3.6).

Two sets of bar graphs are shown. The left is labeled, “Before reaction,” and the right is labeled, “At equilibrium.” Both graphs have y-axes labeled, “Concentration (M),” and three bars on the x-axes labeled, “Mixture 1,” “Mixture 2,” and “Mixture 3.” The y-axis has a scale beginning at 0.00 and ending at 0.10, with measurement increments of 0.02. The bars on the graphs are color coded and a key is provided with a legend. Red is labeled, “C O;” blue is labeled, “H subscript 2 O;” green is labeled, “C O subscript 2,” and yellow is labeled, “H subscript 2.” The graph on the left shows the red bar for mixture one just above 0.02 and the blue bar near 0.05. For mixture two, the green bar is near 0.05, and the yellow bar is near 0.09. For mixture 3, the red bar is near 0.01, the blue bar is slightly above that with green and yellow topping it off at 0.02. On the right graph, the bar for mixture one shows the red bar slightly above 0.01, the blue bar stacked on it rising slightly above 0.02, the green rising near 0.04, and the yellow bar reaching near 0.05. A label above this bar reads, “Q equals 0.640.” The bar for mixture two shows the red bar slightly above 0.02, the blue bar stacked on it rising near 0.05, the green rising near 0.07, and the yellow bar reaching near 0.10. A label above this bar reads “Q equals 0.640.” The bar for mixture three shows the red bar near 0.01, the blue bar stacked on it rising slightly above 0.01, the green rising near 0.02, and the yellow bar reaching 0.02. A label above this bar reads “Q equals 0.640”.

Example 12.3.3: Predicting the Direction of Reaction

Given here are the starting concentrations of reactants and products for three experiments involving this reaction:

$$CO(g) + H_2O(g) \rightleftharpoons CO_2(g) + H_2(g)$$

with $K_c = 0.64$. Determine in which direction the reaction proceeds as it goes to equilibrium in each of the three experiments shown.

Reactant/Products for Three Experiments

Reactants/Products	Experiment 1	Experiment 2	Experiment 3
$[CO]_i$	0.0203 M	0.011 M	0.0094 M
$[H_2O]_i$	0.0203 M	0.0011 M	0.0025 M
$[CO_2]_i$	0.0040 M	0.037 M	0.0015 M
$[H_2]_i$	0.0040 M	0.046 M	0.0076 M

Solution

Experiment 1:

$$Q_c = \frac{[CO2][H2]}{[CO][H2O]} = \frac{(0.0040)(0.0040)}{(0.0203)(0.0203)} = 0.039.$$

$Q_c < K_c$ (0.039 < 0.64)

The reaction will shift to the right.

Experiment 2:

$$Q_c = \frac{[CO2][H2]}{[CO][H2O]} = \frac{(0.037)(0.046)}{(0.011)(0.0011)} = 1.4 \times 10^2$$

$Q_c > K_c$ (140 > 0.64)

The reaction will shift to the left.

Experiment 3:

$$Q_c = \frac{[CO2][H2]}{[CO][H2O]} = \frac{(0.0015)(0.0076)}{(0.0094)(0.0025)} = 0.48$$

$Q_c < K_c$ (0.48 < 0.64)

The reaction will shift to the right.

Exercise 12.3.3

Calculate the reaction quotient and determine the direction in which each of the following reactions will proceed to reach equilibrium.

(a) A 1.00-L flask containing 0.0500 mol of NO(g), 0.0155 mol of Cl_2(g), and 0.500 mol of NOCl:

$$2\,NO(g) + Cl_2(g) \rightleftharpoons 2\,NOCl(g) \quad K_c = 4.6 \times 10^4$$

(b) A 5.0-L flask containing 17 g of NH_3, 14 g of N_2, and 12 g of H_2:

$$N_2(g) + 3\,H_2(g) \rightleftharpoons 2\,NH_3(g) \quad K_c = 0.060$$

(c) A 2.00-L flask containing 230 g of SO_3(g):

$$2\,SO_3(g) \rightleftharpoons 2\,SO_2(g) + O_2(g) \quad K_c = 0.230$$

Answer a

$Q_c = 6.45 \times 10^3$, shifts right.

Answer b

$Q_c = 0.12$, shifts left.

Answer c

$Q_c = 0$, shifts right

In Example **12.3.2**, it was mentioned that the common practice is to omit units when evaluating reaction quotients and equilibrium constants. It should be pointed out that using concentrations in these computations is a convenient but simplified approach that sometimes leads to results that seemingly conflict with the law of mass action. For example, equilibria involving aqueous ions often exhibit equilibrium constants that vary quite significantly (are *not* constant) at high solution concentrations. This may be avoided by computing K_c values using the *activities* of the reactants and products in the equilibrium system instead of their concentrations. The activity of a substance is a measure of its effective concentration under specified conditions. While a detailed discussion of this important quantity is beyond the scope of an introductory text, it is necessary to be aware of a few important aspects:

- Activities are dimensionless (**unitless**) quantities and are in essence “adjusted” concentrations.
- For relatively dilute solutions, a solute's activity and its molar concentration are roughly equal.
- Activities for pure condensed phases (solids and liquids) are equal to 1.
- Activities for solvents in dilute solutions are equal to 1.

As a consequence of this last two aspects, Q_c and K_c expressions do not contain terms for solids or liquids or solvents in dilute solutions (being numerically equal to 1, these terms have no effect on the expression's value). Several examples of equilibria yielding such expressions will be encountered in this section.

Homogeneous Equilibria

A homogeneous equilibrium is one in which all of the reactants and products are present in a single solution (by definition, a homogeneous mixture). In this chapter, we will concentrate on the two most common types of homogeneous equilibria: those occurring in liquid-phase solutions and those involving exclusively gaseous species. Reactions between solutes in liquid solutions belong to one type of homogeneous equilibria. The chemical species involved can be molecules, ions, or a mixture of both. Several examples are provided here:

Example 1

$$\mathrm{C_2H_2}(aq)+2\,\mathrm{Br_2}(aq) \rightleftharpoons \mathrm{C_2H_2Br_4}(aq) \tag{12.3.7}$$

with associated equilibrium constant

$$K_c = \frac{[C2H2Br4]}{[C2H2][Br2]^2} \tag{12.3.8}$$

Example 2

$$\mathrm{I_2}(aq) + \mathrm{I^-}(aq) \rightleftharpoons \mathrm{I_3^-}(aq) \tag{12.3.9}$$

with associated equilibrium constant

$$K_c = \frac{[I3-]}{[I2][I-]} \tag{12.3.10}$$

Example 3

$$\mathrm{Hg_2^{2+}}(aq) + \mathrm{NO_3^-}(aq)+3\,\mathrm{H_3O^+}(aq) \rightleftharpoons 2\,\mathrm{Hg^{2+}}(aq) + \mathrm{HNO_2}(aq) + 4\,\mathrm{H_2O}(l) \tag{12.3.11}$$

with associated equilibrium constant

$$K_c = \frac{[Hg^2+]^2[HNO2]}{[Hg2^2+][NO3-][H3O+]^3} \tag{12.3.12}$$

Example 4

$$\mathrm{HF}(aq) + \mathrm{H_2O}(l) \rightleftharpoons \mathrm{H_3O^+}(aq) + \mathrm{F^-}(aq) \tag{12.3.13}$$

with associated equilibrium constant

$$K_c = \frac{[H3O+][F-]}{[HF]} \tag{12.3.14}$$

Example 5

$$\mathrm{NH_3}(aq) + \mathrm{H_2O}(l) \rightleftharpoons \mathrm{NH_4^+}(aq) + \mathrm{OH^-}(aq) \tag{12.3.15}$$

with associated equilibrium constant

$$K_c = \frac{[NH4+][OH-]}{[NH3]} \tag{12.3.16}$$

In each of these examples, the equilibrium system is an aqueous solution, as denoted by the *aq* annotations on the solute formulas. Since $H_2O(l)$ is the solvent for these solutions, it is assigned an activity of 1, and thus **does not** appear explicitly as a term in the K_c expression, as discussed earlier, even though it may also appear as a reactant or product in the chemical equation.

Reactions in which all reactants and products are gases represent a second class of homogeneous equilibria. We use molar concentrations in the following examples, but we will see shortly that partial pressures of the gases may be used as well:

Example 1

$$\mathrm{C_2H_6}(g) \rightleftharpoons \mathrm{C_2H_4}(g) + \mathrm{H_2}(g) \tag{12.3.17}$$

with associated equilibrium constant

$$K_c = \frac{[C2H4][H2]}{[C2H6]} \tag{12.3.18}$$

Example 2

$$3\,\mathrm{O_2}(g) \rightleftharpoons 2\,\mathrm{O_3}(g) \tag{12.3.19}$$

with associated equilibrium constant

$$K_c = \frac{[O3]^2}{[O2]^3} \tag{12.3.20}$$

Example 3

$$\mathrm{N_2}(g) + 3\,\mathrm{H_2}(g) \rightleftharpoons 2\,\mathrm{NH_3}(g) \tag{12.3.21}$$

with associated equilibrium constant

$$K_c = \frac{[NH3]^2}{[N2][H2]^3} \tag{12.3.22}$$

Example 4

$$\mathrm{C_3H_8}(g) + 5\,\mathrm{O_2}(g) \rightleftharpoons 3\,\mathrm{CO_2}(g) + 4\,\mathrm{H_2O}(g) \tag{12.3.23}$$

with associated equilibrium constant

$$K_c = \frac{[CO2]^3[H2O]^4}{[C3H8][O2]^5} \tag{12.3.24}$$

Note that the concentration of $\mathrm{H_2O_{(g)}}$ has been included in the last example because water is not the solvent in this gas-phase reaction and its concentration (and activity) changes.

Whenever gases are involved in a reaction, the partial pressure of each gas can be used instead of its concentration in the equation for the reaction quotient because the partial pressure of a gas is directly proportional to its concentration at constant temperature. This relationship can be derived from the ideal gas equation, where M is the molar concentration of gas, $\frac{n}{V}$.

$$PV = nRT \tag{12.3.25}$$

$$P = \left(\frac{n}{V}\right) RT \tag{12.3.26}$$

$$= MRT \tag{12.3.27}$$

Thus, at constant temperature, the pressure of a gas is **directly proportional** to its concentration. Using the partial pressures of the gases, we can write the reaction quotient for the system

$$\mathrm{C_2H_6}(g) \rightleftharpoons \mathrm{C_2H_4}(g) + \mathrm{H_2}(g) \tag{12.3.28}$$

by following the same guidelines for deriving concentration-based expressions:

$$Q_P = \frac{P_{\mathrm{C_2H_4}} P_{\mathrm{H_2}}}{P_{\mathrm{C_2H_6}}} \tag{12.3.29}$$

In this equation we use Q_P to indicate a reaction quotient written with partial pressures: $P_{\mathrm{C_2H_6}}$ is the partial pressure of C_2H_6; $P_{\mathrm{H_2}}$, the partial pressure of H_2; and $P_{\mathrm{C_2H_6}}$, the partial pressure of C_2H_4. At equilibrium:

$$K_P = Q_P = \frac{P_{\mathrm{C_2H_4}} P_{\mathrm{H_2}}}{P_{\mathrm{C_2H_6}}} \tag{12.3.30}$$

The subscript P in the symbol K_P designates an equilibrium constant derived using partial pressures instead of concentrations. The equilibrium constant, K_P, is still a constant, but its numeric value may differ from the equilibrium constant found for the same reaction by using concentrations.

Conversion between a value for K_c, an equilibrium constant expressed in terms of concentrations, and a value for K_P, an equilibrium constant expressed in terms of pressures, is straightforward (a K or Q without a subscript could be either concentration or pressure).

The equation relating K_c and K_P is derived as follows. For the gas-phase reaction:

$$m\mathrm{A} + n\mathrm{B} \rightleftharpoons x\mathrm{C} + y\mathrm{D} \tag{12.3.31}$$

with

$$K_P = \frac{(P_C)^x (P_D)^y}{(P_A)^m (P_B)^n} \tag{12.3.32}$$

$$= \frac{([\mathrm{C}] \times RT)^x ([\mathrm{D}] \times RT)^y}{([\mathrm{A}] \times RT)^m ([\mathrm{B}] \times RT)^n} \tag{12.3.33}$$

$$= \frac{[\mathrm{C}]^x [\mathrm{D}]^y}{[\mathrm{A}]^m [\mathrm{B}]^n} \times \frac{(RT)^{x+y}}{(RT)^{m+n}} \tag{12.3.34}$$

$$= K_c (RT)^{(x+y)-(m+n)} \tag{12.3.35}$$

$$= K_c (RT)^{\Delta n} \tag{12.3.36}$$

The relationship between K_c and K_P is

$$K_P = K_c (RT)^{\Delta n} \tag{12.3.37}$$

In this equation, Δn is the difference between the sum of the coefficients of the *gaseous* products and the sum of the coefficients of the *gaseous* reactants in the reaction (the change in moles of gas between the reactants and the products). For the gas-phase reaction $m\mathrm{A} + n\mathrm{B} \rightleftharpoons x\mathrm{C} + y\mathrm{D}$, we have

$$\Delta n = (x + y) - (m + n) \tag{12.3.38}$$

Example 12.3.4: Calculation of K_P

Write the equations for the conversion of K_c to K_P for each of the following reactions:

a. $\mathrm{C_2H_6}(g) \rightleftharpoons \mathrm{C_2H_4}(g) + \mathrm{H_2}(g)$
b. $\mathrm{CO}(g) + \mathrm{H_2O}(g) \rightleftharpoons \mathrm{CO_2}(g) + \mathrm{H_2}(g)$
c. $\mathrm{N_2}(g) + 3\,\mathrm{H_2}(g) \rightleftharpoons 2\,\mathrm{NH_3}(g)$
d. K_c is equal to 0.28 for the following reaction at 900 °C:

$$\mathrm{CS_2}(g) + 4\,\mathrm{H_2}(g) \rightleftharpoons \mathrm{CH_4}(g) + 2\,\mathrm{H_2S}(g)$$

What is K_P at this temperature?

Solution

(a) $\Delta n = (2) - (1) = 1$

$$K_P = K_c (RT)^{\Delta n} = K_c (RT)^1 = K_c (RT)$$

(b) $\Delta n = (2) - (2) = 0$

$$K_P = K_c (RT)^{\Delta n} = K_c (RT)^0 = K_c$$

(c) $\Delta n = (2) - (1 + 3) = -2$

$$K_P = K_c (RT)^{\Delta n} = K_c (RT)^{-2} = \frac{K_c}{(RT)^2}$$

d) $K_P = K_c (\mathrm{RT})^{\Delta n} = (0.28)[(0.0821)(1173)]^{-2} = 3.0 \times 10^{-5}$

Exercise 12.3.4

Write the equations for the conversion of K_c to K_P for each of the following reactions, which occur in the gas phase:

a. $2\,SO_2(g) + O_2(g) \rightleftharpoons 2\,SO_3(g)$
b. $N_2O_4(g) \rightleftharpoons 2\,NO_2(g)$
c. $C_3H_8(g) + 5\,O_2(g) \rightleftharpoons 3\,CO_2(g) + 4\,H_2O(g)$
d. At 227 °C, the following reaction has K_c = 0.0952:

$$CH_3OH(g) \rightleftharpoons CO(g) + 2\,H_2(g)$$

What would be the value of K_P at this temperature?

Answer a

$K_P = K_c\,(RT)^{-1}$

Answer b

$K_P = K_c\,(RT)$

Answer c

$K_P = K_c\,(RT)$;

Answer d

160 or 1.6×10^2

Heterogeneous Equilibria

A heterogeneous equilibrium is a system in which reactants and products are found in two or more phases. The phases may be any combination of solid, liquid, or gas phases, and solutions. When dealing with these equilibria, remember that solids and pure liquids do not appear in equilibrium constant expressions (the activities of pure solids, pure liquids, and solvents are 1).

Some heterogeneous equilibria involve chemical changes:

Example 1

$$PbCl_2(s) \rightleftharpoons Pb^{2+}(aq) + 2\,Cl^-(aq) \tag{12.3.39}$$

with associated equilibrium constant

$$K_c = [Pb^{2+}][Cl^-]^2 \tag{12.3.40}$$

Example 1

$$CaO(s) + CO_2(g) \rightleftharpoons CaCO_3(s) \tag{12.3.41}$$

with associated equilibrium constant

$$K_c = \frac{1}{[CO_2]} \tag{12.3.42}$$

Example 1

$$C(s) + 2\,S(g) \rightleftharpoons CS_2(g) \tag{12.3.43}$$

with associated equilibrium constant

$$K_c = \frac{[CS2]}{[S]^2} \tag{12.3.44}$$

Other heterogeneous equilibria involve phase changes, for example, the evaporation of liquid bromine, as shown in the following equation:

$$Br_2(l) \rightleftharpoons Br_2(g) \tag{12.3.45}$$

with associated equilibrium constant

$$K_c = [\mathrm{Br_2}] \tag{12.3.46}$$

We can write equations for reaction quotients of heterogeneous equilibria that involve gases, using **partial pressures** instead of concentrations. Two examples are:

$$\mathrm{CaO}(s) + \mathrm{CO_2}(g) \rightleftharpoons \mathrm{CaCO_3}(s) \tag{12.3.47}$$

with associated equilibrium constant

$$K_P = \frac{1}{P_{\mathrm{CO_2}}} \tag{12.3.48}$$

$$\mathrm{C}(s) + 2\,\mathrm{S}(g) \rightleftharpoons \mathrm{CS_2}(g) \tag{12.3.49}$$

with associated equilibrium constant

$$K_P = \frac{P_{\mathrm{CS_2}}}{(P_{\mathrm{S}})^2} \tag{12.3.50}$$

Summary

For any reaction that is at equilibrium, the reaction quotient Q is equal to the equilibrium constant K for the reaction. If a reactant or product is a pure solid, a pure liquid, or the solvent in a dilute solution, the concentration of this component does not appear in the expression for the equilibrium constant. At equilibrium, the values of the concentrations of the reactants and products are constant. Their particular values may vary depending on conditions, but the value of the reaction quotient will always equal K (K_c when using concentrations or K_P when using partial pressures).

A homogeneous equilibrium is an equilibrium in which all components are in the same phase. A heterogeneous equilibrium is an equilibrium in which components are in two or more phases. We can decide whether a reaction is at equilibrium by comparing the reaction quotient with the equilibrium constant for the reaction.

Key Equations

- $Q = \dfrac{[\mathrm{C}]^x[\mathrm{D}]^y}{[\mathrm{A}]^m[\mathrm{B}]^n}$ where $m\mathrm{A} + n\mathrm{B} \rightleftharpoons x\mathrm{C} + y\mathrm{D}$
- $Q_P = \dfrac{(P_C)^x(P_D)^y}{(P_A)^m(P_B)^n}$ where $m\mathrm{A} + n\mathrm{B} \rightleftharpoons x\mathrm{C} + y\mathrm{D}$
- $P = MRT$
- $K_P = K_c\,(RT)^{\Delta n}$

Glossary

equilibrium constant (K)
value of the reaction quotient for a system at equilibrium

heterogeneous equilibria
equilibria between reactants and products in different phases

homogeneous equilibria
equilibria within a single phase

K_c
equilibrium constant for reactions based on concentrations of reactants and products

K_P
equilibrium constant for gas-phase reactions based on partial pressures of reactants and products

law of mass action

when a reversible reaction has attained equilibrium at a given temperature, the reaction quotient remains constant

reaction quotient (*Q*)

ratio of the product of molar concentrations (or pressures) of the products to that of the reactants, each concentration (or pressure) being raised to the power equal to the coefficient in the equation

---

This page titled 12.3: Equilibrium Constants is shared under a CC BY license and was authored, remixed, and/or curated by OpenStax.

- **13.3: Equilibrium Constants** by OpenStax is licensed CC BY 4.0. Original source: https://openstax.org/details/books/chemistry-2e.

12.4: Shifting Equilibria: Le Châtelier's Principle

Learning Objectives

- Describe the ways in which an equilibrium system can be stressed
- Predict the response of a stressed equilibrium using Le Chatelier's principle

As we saw in the previous section, reactions proceed in both directions (reactants go to products and products go to reactants). We can tell a reaction is at equilibrium if the reaction quotient (Q) is equal to the equilibrium constant (K). We next address what happens when a system at equilibrium is disturbed so that Q is no longer equal to K. If a system at equilibrium is subjected to a perturbance or stress (such as a change in concentration) the position of equilibrium changes. Since this stress affects the concentrations of the reactants and the products, the value of Q will no longer equal the value of K. To re-establish equilibrium, the system will either shift toward the products (if $Q < K$) or the reactants (if $Q > K$) until Q returns to the same value as K.

This process is described by Le Chatelier's principle: When a chemical system at equilibrium is disturbed, it returns to equilibrium by counteracting the disturbance. As described in the previous paragraph, the disturbance causes a change in Q; the reaction will shift to re-establish $Q = K$.

Predicting the Direction of a Reversible Reaction

Le Chatelier's principle can be used to predict changes in equilibrium concentrations when a system that is at equilibrium is subjected to a stress. However, if we have a mixture of reactants and products that have not yet reached equilibrium, the changes necessary to reach equilibrium may not be so obvious. In such a case, we can compare the values of Q and K for the system to predict the changes.

A chemical system at equilibrium can be **temporarily** shifted out of equilibrium by adding or removing one or more of the reactants or products. The concentrations of both reactants and products then undergo additional changes to return the system to equilibrium.

The stress on the system in Figure **12.4.1** is the reduction of the equilibrium concentration of SCN^- (lowering the concentration of one of the reactants would cause Q to be larger than K). As a consequence, Le Chatelier's principle leads us to predict that the concentration of $Fe(SCN)^{2+}$ should decrease, increasing the concentration of SCN^- part way back to its original concentration, and increasing the concentration of Fe^{3+} above its initial equilibrium concentration.

Figure 12.4.1: (a) The test tube contains 0.1 M Fe^{3+}. (b) Thiocyanate ion has been added to solution in (a), forming the red $Fe(SCN)^{2+}$ ion. $\mathbf{Fe^{3+}(aq) + SCN^-(aq) \rightleftharpoons Fe(SCN)^{2+}(aq)}$. *(c) Silver nitrate has been added to the solution in (b), precipitating some of the SCN− as the white solid AgSCN.* $\mathbf{Ag^+(aq) + SCN^-(aq) \rightleftharpoons AgSCN(s)}$. *The decrease in the SCN− concentration shifts the first equilibrium in the solution to the left, decreasing the concentration (and lightening color) of the* $Fe(SCN)^{2+}$. *(credit: modification of work by Mark Ott).*

Three capped test tubes held vertically in clamps are shown in pictures labeled, "a," "b," and "c." The test tube in picture a is half filled with a clear, orange liquid. The test tube in picture b is half filled with a dark, burgundy liquid. The test tube in picture c is half filled with a slightly cloudy, orange liquid.

The effect of a change in concentration on a system at equilibrium is illustrated further by the equilibrium of this chemical reaction:

$$\mathbf{H_{2(g)} + I_{2(g)} \rightleftharpoons 2\,HI_{(g)}} \qquad (12.4.1)$$

$$K_c = 50.0 \text{ at } 400°C \tag{12.4.2}$$

The numeric values for this example have been determined experimentally. A mixture of gases at 400 °C with $[H_2] = [I_2] = 0.221\ M$ and $[HI] = 1.563\ M$ is at equilibrium; for this mixture, $Q_c = K_c = 50.0$. If H_2 is introduced into the system so quickly that its concentration doubles before it begins to react (new $[H_2] = 0.442\ M$), the reaction will shift so that a new equilibrium is reached, at which

- $[H_2] = 0.374\ M$,
- $[I_2] = 0.153\ M$, and
- $[HI] = 1.692\ M$.

This gives:

$$Q_c = \frac{[HI]^2}{[H_2][I_2]} = \frac{(1.692)^2}{(0.374)(0.153)} = 50.0 = K_c \tag{12.4.3}$$

We have stressed this system by introducing additional H_2. The stress is relieved when the reaction shifts to the right, using up some (but not all) of the excess H_2, reducing the amount of uncombined I_2, and forming additional HI.

Effect of Change in Pressure on Equilibrium

Sometimes we can change the position of equilibrium by changing the pressure of a system. However, changes in pressure have a measurable effect only in systems in which gases are involved, and then only when the chemical reaction produces a change in the total number of gas molecules in the system. An easy way to recognize such a system is to look for different numbers of moles of gas on the reactant and product sides of the equilibrium. While evaluating pressure (as well as related factors like volume), it is important to remember that equilibrium constants are defined with regard to concentration (for K_c) or partial pressure (for K_P). Some changes to total pressure, like adding an inert gas that is not part of the equilibrium, will change the total pressure but not the partial pressures of the gases in the equilibrium constant expression. Thus, addition of a gas not involved in the equilibrium will not perturb the equilibrium.

As we increase the pressure of a gaseous system at equilibrium, either by decreasing the volume of the system or by adding more of one of the components of the equilibrium mixture, we introduce a stress by increasing the partial pressures of one or more of the components. In accordance with Le Chatelier's principle, a shift in the equilibrium that reduces the total number of molecules per unit of volume will be favored because this relieves the stress. The reverse reaction would be favored by a decrease in pressure.

Consider what happens when we increase the pressure on a system in which NO, O_2, and NO_2 are at equilibrium:

$$2\,NO\,(g) + O_2\,(g) \rightleftharpoons 2\,NO_2\,(g) \tag{12.4.4}$$

The formation of additional amounts of NO_2 decreases the total number of molecules in the system because each time two molecules of NO_2 form, a total of three molecules of NO and O_2 are consumed. This reduces the total pressure exerted by the system and reduces, but does not completely relieve, the stress of the increased pressure. On the other hand, a decrease in the pressure on the system favors decomposition of NO_2 into NO and O_2, which tends to restore the pressure.

Now consider this reaction:

$$N_2\,(g) + O_2\,(g) \rightleftharpoons 2\,NO\,(g) \tag{12.4.5}$$

Because there is no change in the total number of molecules in the system during reaction, a change in pressure does not favor either formation or decomposition of gaseous nitrogen monoxide.

Effect of Change in Temperature on Equilibrium

Changing concentration or pressure perturbs an equilibrium because the reaction quotient is shifted away from the equilibrium value. Changing the temperature of a system at equilibrium has a different effect: A change in temperature actually changes the value of the equilibrium constant. However, we can qualitatively predict the effect of the temperature change by treating it as a stress on the system and applying Le Chatelier's principle.

When hydrogen reacts with gaseous iodine, heat is evolved.

$$\mathrm{H_2(g) + I_2(g) \rightleftharpoons 2\,HI(g)} \quad \Delta H = -9.4\ \mathrm{kJ\ (exothermic)} \tag{12.4.6}$$

Because this reaction is exothermic, we can write it with heat as a product.

$$\mathrm{H_2(g) + I_2(g) \rightleftharpoons 2\,HI(g) + heat} \tag{12.4.7}$$

Increasing the temperature of the reaction increases the internal energy of the system. Thus, increasing the temperature has the effect of increasing the amount of one of the products of this reaction. The reaction shifts to the left to relieve the stress, and there is an increase in the concentration of $\mathrm{H_2}$ and $\mathrm{I_2}$ and a reduction in the concentration of HI. Lowering the temperature of this system reduces the amount of energy present, favors the production of heat, and favors the formation of hydrogen iodide.

When we change the temperature of a system at equilibrium, the equilibrium constant for the reaction changes. Lowering the temperature in the HI system increases the equilibrium constant: At the new equilibrium the concentration of HI has increased and the concentrations of $\mathrm{H_2}$ and $\mathrm{I_2}$ decreased. Raising the temperature decreases the value of the equilibrium constant, from 67.5 at 357 °C to 50.0 at 400 °C.

Temperature affects the equilibrium between $\mathrm{NO_2}$ and $\mathrm{N_2O_4}$ in this reaction

$$\mathrm{N_2O_4(g) \rightleftharpoons 2\,NO_2(g)} \quad \Delta H = 57.20\ \mathrm{kJ} \tag{12.4.8}$$

The positive ΔH value tells us that the reaction is endothermic and could be written

$$\mathrm{heat + N_2O_4(g) \rightleftharpoons 2\,NO_2(g)} \tag{12.4.9}$$

At higher temperatures, the gas mixture has a deep brown color, indicative of a significant amount of brown $\mathrm{NO_2}$ molecules. If, however, we put a stress on the system by cooling the mixture (withdrawing energy), the equilibrium shifts to the left to supply some of the energy lost by cooling. The concentration of colorless $\mathrm{N_2O_4}$ increases, and the concentration of brown $\mathrm{NO_2}$ decreases, causing the brown color to fade.

Catalysts Do Not Affect Equilibrium

As we learned during our study of kinetics, a catalyst can speed up the rate of a reaction. Though this increase in reaction rate may cause a system to reach equilibrium more quickly (by speeding up the forward and reverse reactions), a catalyst has no effect on the value of an equilibrium constant nor on equilibrium concentrations.

The interplay of changes in concentration or pressure, temperature, and the lack of an influence of a catalyst on a chemical equilibrium is illustrated in the industrial synthesis of ammonia from nitrogen and hydrogen according to the equation

$$\mathrm{N_2(g) + 3\,H_2(g) \rightleftharpoons 2\,NH_3(g)} \tag{12.4.10}$$

A large quantity of ammonia is manufactured by this reaction. Each year, ammonia is among the top 10 chemicals, by mass, manufactured in the world. About 2 billion pounds are manufactured in the United States each year. Ammonia plays a vital role in our global economy. It is used in the production of fertilizers and is, itself, an important fertilizer for the growth of corn, cotton, and other crops. Large quantities of ammonia are converted to nitric acid, which plays an important role in the production of fertilizers, explosives, plastics, dyes, and fibers, and is also used in the steel industry.

Fritz Haber

Haber was born in Breslau, Prussia (presently Wroclaw, Poland) in December 1868. He went on to study chemistry and, while at the University of Karlsruhe, he developed what would later be known as the Haber process: the catalytic formation of ammonia from hydrogen and atmospheric nitrogen under high temperatures and pressures.

The work of Nobel Prize recipient Fritz Haber revolutionized agricultural practices in the early 20th century. His work also affected wartime strategies, adding chemical weapons to the artillery.

For this work, Haber was awarded the 1918 Nobel Prize in Chemistry for synthesis of ammonia from its elements. The Haber process was a boon to agriculture, as it allowed the production of fertilizers to no longer be dependent on mined feed stocks such as sodium nitrate.

$$\mathrm{N_2(g) + 3\,H_2(g) \rightleftharpoons 2\,NH_3(g)}$$

Currently, the annual production of synthetic nitrogen fertilizers exceeds 100 million tons and synthetic fertilizer production has increased the number of humans that arable land can support from 1.9 persons per hectare in 1908 to 4.3 in 2008. The availability of nitrogen is a strong limiting factor to the growth of plants. Despite accounting for 78% of air, diatomic nitrogen ($\mathrm{N_2}$) is nutritionally unavailable due the tremendous stability of the nitrogen-nitrogen triple bond. For plants to use atmospheric nitrogen, the nitrogen must be converted to a more bioavailable form (this conversion is called nitrogen fixation).

In addition to his work in ammonia production, Haber is also remembered by history as one of the fathers of chemical warfare. During World War I, he played a major role in the development of poisonous gases used for trench warfare. Regarding his role in these developments, Haber said, “During peace time a scientist belongs to the World, but during war time he belongs to his country.”[1] Haber defended the use of gas warfare against accusations that it was inhumane, saying that death was death, by whatever means it was inflicted. He stands as an example of the ethical dilemmas that face scientists in times of war and the double-edged nature of the sword of science.

Like Haber, the products made from ammonia can be multifaceted. In addition to their value for agriculture, nitrogen compounds can also be used to achieve destructive ends. Ammonium nitrate has also been used in explosives, including improvised explosive devices. Ammonium nitrate was one of the components of the bomb used in the attack on the Alfred P. Murrah Federal Building in downtown Oklahoma City on April 19, 1995.

It has long been known that nitrogen and hydrogen react to form ammonia. However, it became possible to manufacture ammonia in useful quantities by the reaction of nitrogen and hydrogen only in the early 20th century after the factors that influence its equilibrium were understood.

To be practical, an industrial process must give a large yield of product relatively quickly. One way to increase the yield of ammonia is to increase the pressure on the system in which N_2, H_2, and NH_3 are at equilibrium or are coming to equilibrium.

$$\mathrm{N_2(g) + 3\,H_2(g) \rightleftharpoons 2\,NH_3(g)} \tag{12.4.11}$$

The formation of additional amounts of ammonia reduces the total pressure exerted by the system and somewhat reduces the stress of the increased pressure.

Although increasing the pressure of a mixture of N_2, H_2, and NH_3 will increase the yield of ammonia, at low temperatures, the rate of formation of ammonia is slow. At room temperature, for example, the reaction is so slow that if we prepared a mixture of N_2 and H_2, no detectable amount of ammonia would form during our lifetime. The formation of ammonia from hydrogen and nitrogen is an exothermic process:

$$\mathrm{N_2(g) + 3\,H_2(g) \rightarrow 2\,NH_3(g)} \quad \Delta H = -92.2\ \mathrm{kJ} \tag{12.4.12}$$

Thus, increasing the temperature to increase the rate lowers the yield. If we lower the temperature to shift the equilibrium to favor the formation of more ammonia, equilibrium is reached more slowly because of the large decrease of reaction rate with decreasing temperature.

Part of the rate of formation lost by operating at lower temperatures can be recovered by using a catalyst. The net effect of the catalyst on the reaction is to cause equilibrium to be reached more rapidly. In the commercial production of ammonia, conditions of about 500 °C, 150–900 atm, and the presence of a catalyst are used to give the best compromise among rate, yield, and the cost of the equipment necessary to produce and contain high-pressure gases at high temperatures (Figure **12.4.2**).

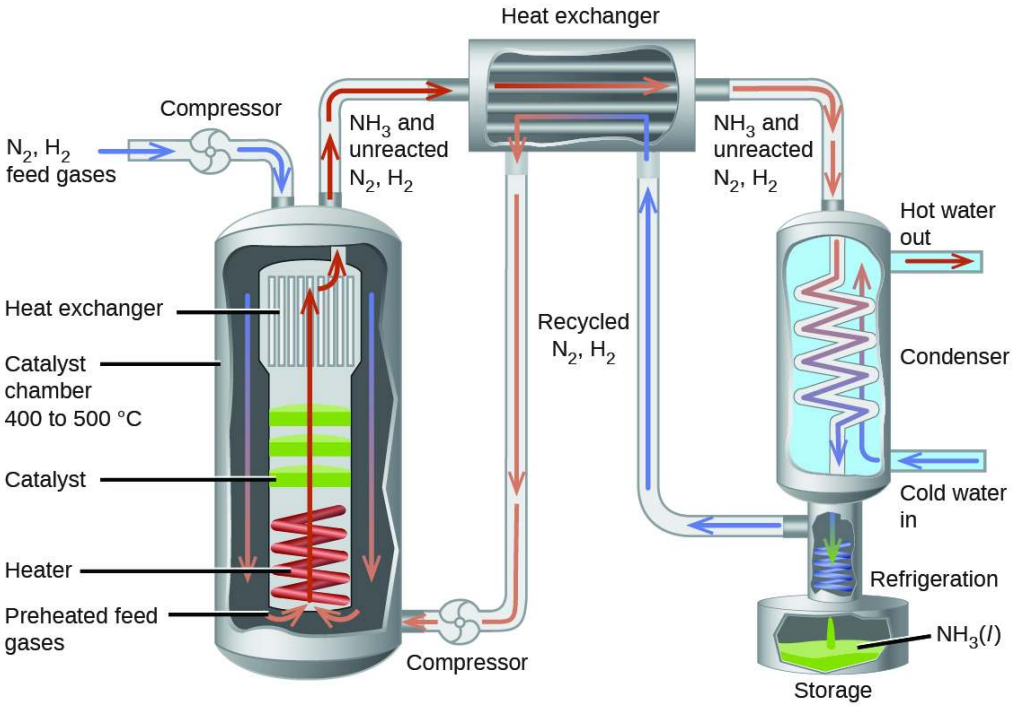

Figure **12.4.2**: Commercial production of ammonia requires heavy equipment to handle the high temperatures and pressures required. This schematic outlines the design of an ammonia plant.

Summary

Systems at equilibrium can be disturbed by changes to temperature, concentration, and, in some cases, volume and pressure; volume and pressure changes will disturb equilibrium if the number of moles of gas is different on the reactant and product sides of the reaction. The system's response to these disturbances is described by Le Chatelier's principle: The system will respond in a way that counteracts the disturbance. Not all changes to the system result in a disturbance of the equilibrium. Adding a catalyst affects the rates of the reactions but does not alter the equilibrium, and changing pressure or volume will not significantly disturb systems with no gases or with equal numbers of moles of gas on the reactant and product side.

Table **12.4.1**: Effects of Disturbances of Equilibrium and K

Disturbance	Observed Change as Equilibrium is Restored	Direction of Shift	Effect on K
reactant added	added reactant is partially consumed	toward products	none
product added	added product is partially consumed	toward reactants	none
decrease in volume/increase in gas pressure	pressure decreases	toward side with fewer moles of gas	none
increase in volume/decrease in gas pressure	pressure increases	toward side with more moles of gas	none
temperature increase	heat is absorbed	toward products for endothermic, toward reactants for exothermic	changes
temperature decrease	heat is given off	toward reactants for endothermic, toward products for exothermic	changes

Footnotes

1. Herrlich, P. “The Responsibility of the Scientist: What Can History Teach Us About How Scientists Should Handle Research That Has the Potential to Create Harm?” *EMBO Reports* 14 (2013): 759–764.

Glossary

Le Chatelier's principle
: when a chemical system at equilibrium is disturbed, it returns to equilibrium by counteracting the disturbance

position of equilibrium
: concentrations or partial pressures of components of a reaction at equilibrium (commonly used to describe conditions before a disturbance)

stress
: change to a reaction's conditions that may cause a shift in the equilibrium

This page titled 12.4: Shifting Equilibria: Le Châtelier’s Principle is shared under a CC BY license and was authored, remixed, and/or curated by OpenStax.

- **13.4: Shifting Equilibria - Le Chatelier’s Principle** by OpenStax is licensed CC BY 4.0. Original source: https://openstax.org/details/books/chemistry-2e.

12.5: Equilibrium Calculations

Learning Objectives

- Write equations representing changes in concentration and pressure for chemical species in equilibrium systems
- Use algebra to perform various types of equilibrium calculations

We know that at equilibrium, the value of the reaction quotient of any reaction is equal to its equilibrium constant. Thus, we can use the mathematical expression for Q to determine a number of quantities associated with a reaction at equilibrium or approaching equilibrium. While we have learned to identify in which direction a reaction will shift to reach equilibrium, we want to extend that understanding to quantitative calculations. We do so by evaluating the ways that the concentrations of products and reactants change as a reaction approaches equilibrium, keeping in mind the stoichiometric ratios of the reaction. This algebraic approach to equilibrium calculations will be explored in this section.

Changes in concentrations or pressures of reactants and products occur as a reaction system approaches equilibrium. In this section we will see that we can relate these changes to each other using the coefficients in the balanced chemical equation describing the system. We use the decomposition of ammonia as an example.

On heating, ammonia reversibly decomposes into nitrogen and hydrogen according to this equation:

$$2\,\mathrm{NH_3}(g) \rightleftharpoons \mathrm{N_2}(g) + 3\,\mathrm{H_2}(g)$$

If a sample of ammonia decomposes in a closed system and the concentration of N_2 increases by 0.11 M, the change in the N_2 concentration, $\Delta[N_2]$, the final concentration minus the initial concentration, is 0.11 M. The change is positive because the concentration of N_2 increases.

The change in the H_2 concentration, $\Delta[H_2]$, is also positive—the concentration of H_2 increases as ammonia decomposes. The chemical equation tells us that the change in the concentration of H_2 is three times the change in the concentration of N_2 because for each mole of N_2 produced, 3 moles of H_2 are produced.

$$\begin{aligned}\Delta[\mathrm{H_2}] &= 3 \times \Delta[\mathrm{N_2}] \\ &= 3 \times (0.11\ M) \\ &= 0.33\ M\end{aligned}$$

The change in concentration of NH_3, $\Delta[NH_3]$, is twice that of $\Delta[N_2]$; the equation indicates that 2 moles of NH_3 must decompose for each mole of N_2 formed. However, the change in the NH_3 concentration is negative because the concentration of ammonia *decreases* as it decomposes.

$$\begin{aligned}\Delta[\mathrm{NH_3}] &= -2 \times \Delta[\mathrm{N_2}] \\ &= -2 \times (0.11\ M) \\ &= -0.22\ M\end{aligned}$$

We can relate these relationships directly to the coefficients in the equation

$$\begin{array}{ccccc} 2\,\mathrm{NH_3}(g) & \rightleftharpoons & \mathrm{N_2}(g) & + & 3\,\mathrm{H_2}(g) \\ \Delta[\mathrm{NH_3}] = -2 \times \Delta[\mathrm{N_2}] & & \Delta[\mathrm{N_2}] = 0.11\ M & & \Delta[\mathrm{H_2}] = 3 \times \Delta[\mathrm{N_2}] \end{array} \quad \begin{array}{r} (12.5.1) \\ (12.5.2) \end{array}$$

Note that all the changes on one side of the arrows are of the same sign and that all the changes on the other side of the arrows are of the opposite sign.

If we did not know the magnitude of the change in the concentration of N_2, we could represent it by the symbol x.

$$\Delta[\mathrm{N_2}] = x$$

The changes in the other concentrations would then be represented as:

$$\Delta[\mathrm{H_2}] = 3 \times \Delta[\mathrm{N_2}] = 3x$$

$$\Delta[\mathrm{NH_3}] = -2 \times \Delta[\mathrm{N_2}] = -2x$$

The coefficients in the Δ terms are identical to those in the balanced equation for the reaction.

$$2\,NH_3(g) \rightleftharpoons N_2(g) + 3\,H_2(g) \tag{12.5.3}$$
$$-2x \qquad x \qquad 3x \tag{12.5.4}$$

The simplest way for us to find the coefficients for the concentration changes in any reaction is to use the coefficients in the balanced chemical equation. The sign of the coefficient is positive when the concentration increases; it is negative when the concentration decreases.

Example 12.5.1: Determining Relative Changes in Concentration

Complete the changes in concentrations for each of the following reactions.

(a)

$$C_2H_2(g) + 2\,Br_2(g) \rightleftharpoons C_2H_2Br_4(g) \tag{12.5.5}$$
$$x \qquad \_\_\_\_ \qquad \_\_\_\_ \tag{12.5.6}$$

(b)

$$I_2(aq) + I^-(aq) \rightleftharpoons I_3^-(aq) \tag{12.5.7}$$
$$\_\_\_\_ \qquad \_\_\_\_ \qquad x \tag{12.5.8}$$

(c)

$$C_3H_8(g) + 5\,O_2(g) \rightleftharpoons 3\,CO_2(g) + 4\,H_2O(g) \tag{12.5.9}$$
$$x \qquad \_\_\_\_ \qquad \_\_\_\_ \qquad \_\_\_\_ \tag{12.5.10}$$

Solution

(a)

$$C_2H_2(g) + 2\,Br_2(g) \rightleftharpoons C_2H_2Br_4(g) \tag{12.5.11}$$
$$x \qquad 2x \qquad -x \tag{12.5.12}$$

(b)

$$I_2(aq) + I^-(aq) \rightleftharpoons I_3^-(aq) \tag{12.5.13}$$
$$-x \qquad -x \qquad x \tag{12.5.14}$$

(c)

$$C_3H_8(g) + 5\,O_2(g) \rightleftharpoons 3\,CO_2(g) + 4\,H_2O(g) \tag{12.5.15}$$
$$x \qquad 5x \qquad -3x \qquad -4x \tag{12.5.16}$$

Exercise 12.5.1

Complete the changes in concentrations for each of the following reactions:

(a)

$$2\,SO_2(g) + O_2(g) \rightleftharpoons 2\,SO_3(g) \tag{12.5.17}$$
$$\_\_\_\_ \qquad x \qquad \_\_\_\_ \tag{12.5.18}$$

(b)

$$C_4H_8(g) \rightleftharpoons 2\,C_2H_4(g) \tag{12.5.19}$$
$$\_\_\_\_ \qquad -2x \tag{12.5.20}$$

(c)

$$4\,NH_3(g) + 7\,H_2O(g) \rightleftharpoons 4\,NO_2(g) + 6\,H_2O(g) \tag{12.5.21}$$
$$\_\_\_\_ \qquad \_\_\_\_ \qquad \_\_\_\_ \qquad \_\_\_\_ \tag{12.5.22}$$

Answer a

$2x$, x, $-2x$

Answer b

x, $-2x$

Answer c

$4x$, $7x$, $-4x$, $-6x$ or $-4x$, $-7x$, $4x$, $6x$

Calculations Involving Equilibrium Concentrations

Because the value of the reaction quotient of any reaction at equilibrium is equal to its equilibrium constant, we can use the mathematical expression for Q_c (i.e., *the law of mass action*) to determine a number of quantities associated with a reaction at equilibrium. It may help if we keep in mind that $Q_c = K_c$ (at equilibrium) in all of these situations and that there are only three basic types of calculations:

1. **Calculation of an equilibrium constant**. If concentrations of reactants and products at equilibrium are known, the value of the equilibrium constant for the reaction can be calculated.
2. **Calculation of missing equilibrium concentrations**. If the value of the equilibrium constant and all of the equilibrium concentrations, except one, are known, the remaining concentration can be calculated.
3. **Calculation of equilibrium concentrations from initial concentrations**. If the value of the equilibrium constant and a set of concentrations of reactants and products that are not at equilibrium are known, the concentrations at equilibrium can be calculated.

A similar list could be generated using Q_P, K_P, and partial pressure. We will look at solving each of these cases in sequence.

Calculation of an Equilibrium Constant

Since the law of mass action is the only equation we have to describe the relationship between K_c and the concentrations of reactants and products, any problem that requires us to solve for K_c must provide enough information to determine the reactant and product concentrations at equilibrium. Armed with the concentrations, we can solve the equation for K_c, as it will be the only unknown.

Example **12.5.1** showed us how to determine the equilibrium constant of a reaction if we know the concentrations of reactants and products at equilibrium. The following example shows how to use the stoichiometry of the reaction and a combination of initial concentrations and equilibrium concentrations to determine an equilibrium constant. This technique, commonly called an ICE table —for **I**nitial, **C**hange, and **E**quilibrium–will be helpful in solving many equilibrium problems. A chart is generated beginning with the equilibrium reaction in question. Underneath the reaction the initial concentrations of the reactants and products are listed—these conditions are usually provided in the problem and we consider no shift toward equilibrium to have happened. The next row of data is the change that occurs as the system shifts toward equilibrium—do not forget to consider the reaction stoichiometry as described in a previous section of this chapter. The last row contains the concentrations once equilibrium has been reached.

Example 12.5.2: Calculation of an Equilibrium Constant

Iodine molecules react reversibly with iodide ions to produce triiodide ions.

$$\mathrm{I_2}(aq) + \mathrm{I^-}(aq) \rightleftharpoons \mathrm{I_3^-}(aq)$$

If a solution with the concentrations of I_2 and I^- both equal to 1.000×10^{-3} M before reaction gives an equilibrium concentration of I_2 of 6.61×10^{-4} M, what is the equilibrium constant for the reaction?

Solution

We will begin this problem by calculating the changes in concentration as the system goes to equilibrium. Then we determine the equilibrium concentrations and, finally, the equilibrium constant. First, we set up a table with the initial concentrations, the changes in concentrations, and the equilibrium concentrations using $-x$ as the change in concentration of I_2.

	I_2	+	I^-	$\rightleftharpoons$	I_3^-
Initial concentration (M)	1.000×10^{-3}		1.000×10^{-3}		0
Change (M)	$-x$		$-x$		$+x$
Equilibrium concentration (M)	$1.000 \times 10^{-3} - x$		$1.000 \times 10^{-3} - x$		x

Since the equilibrium concentration of I_2 is given, we can solve for x. At equilibrium the concentration of I_2 is 6.61×10^{-4} M so that

$$1.000 \times 10^{-3} - x = 6.61 \times 10^{-4}$$

$$x = 1.000 \times 10^{-3} - 6.61 \times 10^{-4}$$

$$= 3.39 \times 10^{-4}\ M$$

Now we can fill in the table with the concentrations at equilibrium.

	I_2 + I^- ⇌ I_3^-		
Initial concentration (*M*)	1.000×10^{-3}	1.000×10^{-3}	0
Change (*M*)	$-x = -3.39 \times 10^{-4}$	$-x$	$+x$
Equilibrium concentration (*M*)	6.61×10^{-4}	6.61×10^{-4}	3.39×10^{-4}

We now calculate the value of the equilibrium constant.

$$K_c = Q_c = \frac{[I3-]}{[I2][I-]}$$

$$= \frac{3.39 \times 10^{-4}\ M}{(6.61 \times 10^{-4}\ M)(6.61 \times 10^{-4}\ M)} = 776$$

Exercise 12.5.2

Ethanol and acetic acid react and form water and ethyl acetate, the solvent responsible for the odor of some nail polish removers.

$$C_2H_5OH + CH_3CO_2H \rightleftharpoons CH_3CO_2C_2H_5 + H_2O$$

When 1 mol each of C_2H_5OH and CH_3CO_2H are allowed to react in 1 L of the solvent dioxane, equilibrium is established when $\frac{1}{3}$ mol of each of the reactants remains. Calculate the equilibrium constant for the reaction. (Note: Water is not a solvent in this reaction.)

Answer

$K_c = 4$

Calculation of a Missing Equilibrium Concentration

If we know the equilibrium constant for a reaction and know the concentrations at equilibrium of all reactants and products except one, we can calculate the missing concentration.

Example 12.5.3: Calculation of a Missing Equilibrium Concentration

Nitrogen oxides are air pollutants produced by the reaction of nitrogen and oxygen at high temperatures. At 2000 °C, the value of the equilibrium constant for the reaction, $N_2(g) + O_2(g) \rightleftharpoons 2NO(g)$, is 4.1×10^{-4}. Find the concentration of NO(g) in an equilibrium mixture with air at 1 atm pressure at this temperature. In air, $[N_2]$ = 0.036 mol/L and $[O_2]$ 0.0089 mol/L.

Solution

We are given all of the equilibrium concentrations except that of NO. Thus, we can solve for the missing equilibrium concentration by rearranging the equation for the equilibrium constant.

$$K_c = Q_c = \frac{[NO]^2}{[N2][O2]}$$

$$[NO]^2 = K_c[N_2][O_2]$$

$$[NO] = \sqrt{K_c[N_2][O_2]}$$

$$= \sqrt{(4.1 \times 10^{-4})(0.036)(0.0089)}$$

$$= \sqrt{1.31 \times 10^{-7}}$$

$$= 3.6 \times 10^{-4}$$

Thus [NO] is 3.6×10^{-4} mol/L at equilibrium under these conditions.

We can check our answer by substituting all equilibrium concentrations into the expression for the reaction quotient to see whether it is equal to the equilibrium constant.

$$Q_c = \frac{[NO]^2}{[N2][O2]}$$

$$= \frac{(3.6 \times 10^{-4})^2}{(0.036)(0.0089)}$$

$$= 4.0 \times 10^{-4} = K_c$$

The answer checks; our calculated value gives the equilibrium constant within the error associated with the significant figures in the problem.

? Exercise 12.5.3

The equilibrium constant for the reaction of nitrogen and hydrogen to produce ammonia at a certain temperature is 6.00×10^{-2}. Calculate the equilibrium concentration of ammonia if the equilibrium concentrations of nitrogen and hydrogen are 4.26 *M* and 2.09 *M*, respectively.

Answer

1.53 mol/L

Calculation of Changes in Concentration

If we know the equilibrium constant for a reaction and a set of concentrations of reactants and products that are *not at equilibrium*, we can calculate the changes in concentrations as the system comes to equilibrium, as well as the new concentrations at equilibrium. The typical procedure can be summarized in four steps.

1. Determine the direction the reaction proceeds to come to equilibrium.
   - Write a balanced chemical equation for the reaction.
   - If the direction in which the reaction must proceed to reach equilibrium is not obvious, calculate Q_c from the initial concentrations and compare to K_c to determine the direction of change.
2. Determine the relative changes needed to reach equilibrium, then write the equilibrium concentrations in terms of these changes.
   - Define the changes in the initial concentrations that are needed for the reaction to reach equilibrium. Generally, we represent the smallest change with the symbol *x* and express the other changes in terms of the smallest change.
   - Define missing equilibrium concentrations in terms of the initial concentrations and the changes in concentration determined in (a).
3. Solve for the change and the equilibrium concentrations.
   - Substitute the equilibrium concentrations into the expression for the equilibrium constant, solve for *x*, and check any assumptions used to find *x*.
   - Calculate the equilibrium concentrations.
4. Check the arithmetic.
   - Check the calculated equilibrium concentrations by substituting them into the equilibrium expression and determining whether they give the equilibrium constant.

Sometimes a particular step may differ from problem to problem—it may be more complex in some problems and less complex in others. However, every calculation of equilibrium concentrations from a set of initial concentrations will involve these steps.

In solving equilibrium problems that involve changes in concentration, sometimes it is convenient to set up an ICE table, as described in the previous section.

Example 12.5.4: Calculation of Concentration as a Reaction Equilibrates

Under certain conditions, the equilibrium constant for the decomposition of $PCl_5(g)$ into $PCl_3(g)$ and $Cl_2(g)$ is 0.0211. What are the equilibrium concentrations of PCl_5, PCl_3, and Cl_2 if the initial concentration of PCl_5 was 1.00 *M*?

Solution

Use the stepwise process described earlier.

1. The balanced equation for the decomposition of PCl_5 is

$$\mathbf{PCl_5}(g) \rightleftharpoons \mathbf{PCl_3}(g) + \mathbf{Cl_2}(g)$$

Because we have no products initially, $Q_c = 0$ and the reaction will proceed to the right.

- Let us represent the increase in concentration of PCl_3 by the symbol *x*. The other changes may be written in terms of *x* by considering the coefficients in the chemical equation.

$$\mathbf{PCl_5}(g) \rightleftharpoons \mathbf{PCl_3}(g) + \mathbf{Cl_2}(g) \tag{12.5.23}$$
$$-x \qquad x \qquad x \tag{12.5.24}$$

- The changes in concentration and the expressions for the equilibrium concentrations are:

	$PCl_5 \rightleftharpoons PCl_3 + Cl_2$		
Initial concentration (*M*)	1.00	0	0
Change (*M*)	$-x$	$+x$	$+x$
Equilibrium concentration (*M*)	$1.00 - x$	$0 + x = x$	$0 + x = x$

This table has two main columns and four rows. The first row for the first column does not have a heading and then has the following in the first column: Initial concentration (M), Change (M), Equilibrium concentration (M). The second column has the header, “P C l subscript 5 equilibrium arrow P C l subscript 3 plus C l subscript 2.” Under the second column is a subgroup of three rows and three columns. The first column has the following: 1.00, negative x, 1.00 minus x. The second column has the following: 0, positive x, 0 plus x equals x. The third column has the following: 0, positive x, 0 plus x equals x.

- Substituting the equilibrium concentrations into the equilibrium constant equation gives

$$K_c = \frac{[PCl3][Cl2]}{[PCl5]} = 0.0211$$
$$= \frac{(x)(x)}{(1.00 - x)}$$

This equation contains only one variable, *x*, the change in concentration. We can write the equation as a quadratic equation and solve for *x* using the quadratic formula.

$$0.0211 = \frac{(x)(x)}{(1.00 - x)}$$
$$0.0211(1.00 - x) = x^2$$
$$x^2 + 0.0211x - 0.0211 = 0$$

An equation of the form $ax^2 + bx + c = 0$ can be rearranged to solve for *x*:

$$x = \frac{-b \pm \sqrt{b^2 - 4ac}}{2a}$$

In this case, $a = 1$, $b = 0.0211$, and $c = -0.0211$. Substituting the appropriate values for *a*, *b*, and *c* yields:

$$x = \frac{-0.0211 \pm \sqrt{(0.0211)^2 - 4(1)(-0.0211)}}{2(1)}$$
$$= \frac{-0.0211 \pm \sqrt{(4.45 \times 10^{-4}) + (8.44 \times 10^{-2})}}{2}$$
$$= \frac{-0.0211 \pm 0.291}{2}$$

Hence

$$x = \frac{-0.0211 + 0.291}{2} = 0.135$$

or

$$x = \frac{-0.0211 - 0.291}{2} = -0.156$$

Quadratic equations often have two different solutions, one that is physically possible and one that is physically impossible (an extraneous root). In this case, the second solution (−0.156) is physically impossible because we know the change must be a positive number (otherwise we would end up with negative values for concentrations of the products). Thus, x = 0.135 M.

The equilibrium concentrations are

$[PCl_5] = 1.00 - 0.135 = 0.87\ M$
$[PCl_3] = x = 0.135\ M$
$[Cl_2] = x = 0.135\ M$

- Substitution into the expression for K_c (to check the calculation) gives

$$K_c = \frac{[PCl3][Cl2]}{[PCl5]} = \frac{(0.135)(0.135)}{0.87} = 0.021$$

The equilibrium constant calculated from the equilibrium concentrations is equal to the value of K_c given in the problem (when rounded to the proper number of significant figures). Thus, the calculated equilibrium concentrations check.

? Exercise 12.5.4A

Acetic acid, CH_3CO_2H, reacts with ethanol, C_2H_5OH, to form water and ethyl acetate, $CH_3CO_2C_2H_5$.

$$CH_3CO_2H + C_2H_5OH \rightleftharpoons CH_3CO_2C_2H_5 + H_2O$$

The equilibrium constant for this reaction with dioxane as a solvent is 4.0. What are the equilibrium concentrations when a mixture that is 0.15 M in CH_3CO_2H, 0.15 M in C_2H_5OH, 0.40 M in $CH_3CO_2C_2H_5$, and 0.40 M in H_2O are mixed in enough dioxane to make 1.0 L of solution?

Answer

$[CH_3CO_2H]$ = 0.36 M, $[C_2H_5OH]$ = 0.36 M, $[CH_3CO_2C_2H_5]$ = 0.17 M, $[H_2O]$ = 0.17 M

? Exercise 12.5.4B

A 1.00-L flask is filled with 1.00 moles of H_2 and 2.00 moles of I_2. The value of the equilibrium constant for the reaction of hydrogen and iodine reacting to form hydrogen iodide is 50.5 under the given conditions. What are the equilibrium concentrations of H_2, I_2, and HI in moles/L?

$$H_2(g) + I_2(g) \rightleftharpoons 2\,HI(g)$$

Answer

$[H_2]$ = 0.06 M, $[I_2]$ = 1.06 M, [HI] = 1.88 M

Sometimes it is possible to use chemical insight to find solutions to equilibrium problems without actually solving a quadratic (or more complicated) equation. First, however, it is useful to verify that equilibrium can be obtained starting from two extremes: all (or mostly) reactants and all (or mostly) products.

Consider the ionization of 0.150 M HA, a weak acid.

$$HA(aq) \rightleftharpoons H^+(aq) + A^-(aq) \quad K_c = 6.80 \times 10^{-4}$$

The most obvious way to determine the equilibrium concentrations would be to start with only reactants. This could be called the "all reactant" starting point. Using x for the amount of acid ionized at equilibrium, this is the ICE table and solution.

	$HA(aq) \rightleftharpoons H^+(aq) + A^-(aq)$		
Initial concentration (*M*)	0.150	0	0
Change (*M*)	$-x$	x	x
Equilibrium concentration (*M*)	$0.150 - x$	x	x

This table has two main columns and four rows. The first row for the first column does not have a heading and then has the following: Initial pressure (M), Change (M), Equilibrium (M). The second column has the header, “H A (a q) equilibrium arrow H superscript plus sign (a q) plus A subscript negative sign (a q).” Under the second column is a subgroup of three columns and three rows. The first column has the following: 0.150, negative x, 0.150 minus x. The second column has the following: 0, x, x. The third column has the following: 0, x, x.

Setting up and solving the quadratic equation gives

$$K_c = \frac{[H+][A-]}{[HA]} = \frac{(x)(x)}{(0.150 - x)} = 6.80 \times 10^{-4}$$
$$x^2 + 6.80 \times 10^{-4}x - 1.02 \times 10^{-4} = 0$$
$$x = -6.80 \times 10^{-4} \pm \sqrt{(6.80 \times 10^{-4})^2 - (4)(1)(-1.02 \times 10^{-4})}(2)(1)$$
$$x = 0.00977\ M \text{ or } -0.0104\ M$$

Using the positive (physical) root, the equilibrium concentrations are

$$[\mathrm{HA}] = 0.150 - x = 0.140\ M$$
$$[\mathrm{H^+}] = [\mathrm{A^-}] = x = 0.00977\ M$$

A less obvious way to solve the problem would be to assume all the HA ionizes first, then the system comes to equilibrium. This could be called the “all product” starting point. Assuming all of the HA ionizes gives

$$[\mathrm{HA}] = 0.150 - 0.150 = 0\ M$$
$$[\mathrm{H^+}] = 0 + 0.150 = 0.150\ M$$
$$[\mathrm{A^-}] = 0 + 0.150 = 0.150\ M$$

Using these as initial concentrations and “*y*” to represent the concentration of HA at equilibrium, this is the ICE table for this starting point.

	$HA(aq) \rightleftharpoons H^+(aq) + A^-(aq)$		
Initial concentration (*M*)	0	0.150	0.150
Change (*M*)	$+y$	$-y$	$-y$
Equilibrium concentration (*M*)	y	$0.150 - y$	$0.150 - y$

This table has two main columns and four rows. The first row for the first column does not have a heading and then has the following: Initial pressure (M), Change (M), Equilibrium (M). The second column has the header, “H A (a q) equilibrium arrow H superscript plus sign (a q) plus A subscript negative sign (a q).” Under the second column is a subgroup of three columns and three rows. The first column has the following: 0, positive y, y. The second column has the following: 0.150, negative y, 0.150 minus y. The third column has the following: 0.150, negative y, and 0.150 minus y.

Setting up and solving the quadratic equation gives

$$K_c = \frac{[H+][A-]}{[HA]} = \frac{(0.150 - y)(0.150 - y)}{(y)} = 6.80 \times 10^{-4}$$
$$6.80 \times 10^{-4}y = 0.0225 - 0.300y + y^2$$

Retain a few extra significant figures to minimize rounding problems.

$$y^2 - 0.30068y + 0.022500 = 0$$

$$y = \frac{0.30068 \pm \sqrt{(0.30068)^2 - (4)(1)(0.022500)}}{(2)(1)}$$

$$y = \frac{0.30068 \pm 0.020210}{2}$$

Rounding each solution to three significant figures gives

$$y = 0.160\ M \text{ or } y = 0.140\ M$$

Using the physically significant root (0.140 M) gives the equilibrium concentrations as

$$[\mathrm{HA}] = y = 0.140\ M$$
$$[\mathrm{H^+}] = 0.150 - y = 0.010\ M$$
$$[\mathrm{A^-}] = 0.150 - y = 0.010\ M$$

Thus, the two approaches give the same results (to three *decimal places*), and show that *both* starting points lead to the same equilibrium conditions. The "all reactant" starting point resulted in a relatively small change (x) because the system was close to equilibrium, while the "all product" starting point had a relatively large change (y) that was nearly the size of the initial concentrations. It can be said that a system that starts "close" to equilibrium will require only a "small" change in conditions (x) to reach equilibrium.

Recall that a small K_c means that very little of the reactants form products and a large K_c means that most of the reactants form products. If the system can be arranged so it starts "close" to equilibrium, then if the change (x) is small compared to any initial concentrations, it can be neglected. Small is usually defined as resulting in an error of less than 5%. The following two examples demonstrate this.

Example 12.5.5: Approximate Solution Starting Close to Equilibrium

What are the concentrations at equilibrium of a 0.15 M solution of HCN?

$$\mathrm{HCN}(aq) \rightleftharpoons \mathrm{H^+}(aq) + \mathrm{CN^-}(aq) \quad K_c = 4.9 \times 10^{-10}$$

Solution

Using "x" to represent the concentration of each product at equilibrium gives this ICE table.

	$\mathrm{HCN}(aq) \rightleftharpoons$	$\mathrm{H^+}(aq)$	+ $\mathrm{CN^-}(aq)$
Initial concentration (M)	0.15	0	0
Change (M)	$-x$	x	x
Equilibrium concentration (M)	$0.15 - x$	x	x

This table has two main columns and four rows. The first row for the first column does not have a heading and then has the following: Initial pressure (M), Change (M), Equilibrium (M). The second column has the header, "H C N (a q) equilibrium arrow H superscript plus sign (a q) plus C N subscript negative sign (a q)." Under the second column is a subgroup of three columns and three rows. The first column has the following: 0.15, negative x, 0.15 minus x. The second column has the following: 0, x, x. The third column has the following: 0, x, x.

The exact solution may be obtained using the quadratic formula with

$$K_c = \frac{(x)(x)}{0.15 - x}$$

solving

$$x^2 + 4.9 \times 10^{-10} - 7.35 \times 10^{-11} = 0$$

$$x = 8.56 \times 10^{-6}\ M\ (3 \text{ sig. figs.}) = 8.6 \times 10^{-6}\ M\ (2 \text{ sig. figs.})$$

Thus $[H^+] = [CN^-] = x = 8.6 \times 10^{-6}\ M$ and $[HCN] = 0.15 - x = 0.15\ M$.

In this case, chemical intuition can provide a simpler solution. From the equilibrium constant and the initial conditions, x must be small compared to 0.15 M. More formally, if $x \ll 0.15$, then $0.15 - x \approx 0.15$. If this assumption is true, then it simplifies obtaining x

$$K_c = \frac{(x)(x)}{0.15 - x} \approx \frac{x^2}{0.15}$$

$$4.9 \times 10^{-10} = \frac{x^2}{0.15}$$

$$x^2 = (0.15)(4.9 \times 10^{-10}) = 7.4 \times 10^{-11}$$

$$x = \sqrt{7.4 \times 10^{-11}} = 8.6 \times 10^{-6}\ M$$

In this example, solving the exact (quadratic) equation and using approximations gave the same result to two significant figures. While most of the time the approximation is a bit different from the exact solution, as long as the error is less than 5%, the approximate solution is considered valid. In this problem, the 5% applies to IF $(0.15 - x) \approx 0.15\ M$, so if

$$\frac{x}{0.15} \times 100\% = \frac{8.6 \times 10^{-6}}{0.15} \times 100\% = 0.006\%$$

is less than 5%, as it is in this case, the assumption is valid. The approximate solution is thus a valid solution.

? Exercise 12.5.5

What are the equilibrium concentrations in a 0.25 M NH_3 solution?

$$NH_3(aq) + H_2O(l) \rightleftharpoons NH_4^+(aq) + OH^-(aq) \quad K_c = 1.8 \times 10^{-5}$$

Assume that x is much less than 0.25 M and calculate the error in your assumption.

Answer

$[OH^-] = [NH_4^+] = 0.0021\ M$; $[NH_3] = 0.25\ M$, error = 0.84%

The second example requires that the original information be processed a bit, but it still can be solved using a small x approximation.

✓ Example 12.5.6: Approximate Solution After Shifting Starting Concentration

Copper(II) ions form a complex ion in the presence of ammonia

$$Cu^{2+}(aq) + 4\,NH_3(aq) \rightleftharpoons Cu(NH_3)_4{}^{2+}(aq) \quad K_c = 5.0 \times 10^{13} = \frac{[Cu(NH3)4^2+]}{[Cu^2 + (aq)][NH3]^4}$$

If 0.010 mol Cu^{2+} is added to 1.00 L of a solution that is 1.00 M NH_3 what are the concentrations when the system comes to equilibrium?

Solution The initial concentration of copper(II) is 0.010 M. The equilibrium constant is very large so it would be better to start with as much product as possible because "all products" is much closer to equilibrium than "all reactants." Note that Cu^{2+} is the limiting reactant; if all 0.010 M of it reacts to form product the concentrations would be

$$[Cu^{2+}] = 0.010 - 0.010 = 0\ M$$

$$[Cu(NH_3)_4{}^{2+}] = 0.010\ M$$

$$[NH_3] = 1.00 - 4 \times 0.010 = 0.96\ M$$

Using these "shifted" values as initial concentrations with x as the free copper(II) ion concentration at equilibrium gives this ICE table.

	$Cu^{2+}(aq)$ +	$4NH_3(aq) \rightleftharpoons Cu(NH_3)_4^{2+}(aq)$	
Initial concentration (*M*)	0	0.96	0.010
Change (*M*)	$+x$	$+4x$	$-x$
Equilibrium concentration (*M*)	x	$0.96 + 4x$	$0.010 - x$

This table has two main columns and four rows. The first row for the first column does not have a heading and then has the following: Initial pressure (M), Change (M), Equilibrium (M). The second column has the header, “C u superscript 2 positive sign (a q) plus 4 N H subscript 3 (a q) equilibrium arrow C u (N H subscript 3) subscript 4 superscript 2 positive sign (a q).” Under the second column is a subgroup of three columns and three rows. The first column has the following: 0, positive x, x. The second column has the following: 0.96, positive 4 x, 0.96 plus 4 x. The third column has the following: 0.010, negative x, 0.010 minus x.

Since we are starting close to equilibrium, x should be small so that

$$0.96 + 4x \approx 0.96\ M$$

$$0.010 - x \approx 0.010\ M$$

$$K_c = \frac{(0.010 - x)}{x(0.96 - 4x)^4} \approx \frac{(0.010)}{x(0.96)^4} = 5.0 \times 10^{13}$$

$$x = \frac{(0.010)}{K_c(0.96)^4} = 2.4 \times 10^{-16}\ M$$

Select the smallest concentration for the 5% rule.

$$\frac{2.4 \times 10^{-16}}{0.010} \times 100\% = 2 \times 10^{-12}\%$$

This is much less than 5%, so the assumptions are valid. The concentrations at equilibrium are

$$[Cu^{2+}] = x = 2.4 \times 10^{-16}\ M$$
$$[NH_3] = 0.96 - 4x = 0.96\ M$$
$$[Cu(NH_3)_4^{2+}] = 0.010 - x = 0.010\ M$$

By starting with the maximum amount of product, this system was near equilibrium and the change (x) was very small. With only a small change required to get to equilibrium, the equation for x was greatly simplified and gave a valid result well within the 5% error maximum.

? Exercise 12.5.6

What are the equilibrium concentrations when 0.25 mol Ni^{2+} is added to 1.00 L of 2.00 *M* NH_3 solution?

$$Ni^{2+}(aq) + 6\,NH_3(aq) \rightleftharpoons Ni(NH_3)_6^{2+}(aq)$$

with $K_c = 5.5 \times 10^8$.

With such a large equilibrium constant, first form as much product as possible, then assume that only a small amount (x) of the product shifts left. Calculate the error in your assumption.

Answer

$[Ni(NH_3)_6^{2+}] = 0.25\ M$, $[NH_3] = 0.50\ M$, $[Ni^{2+}] = 2.9 \times 10^{-8}\ M$, error $= 1.2 \times 10^{-5}\%$

Summary

The ratios of the rate of change in concentrations of a reaction are equal to the ratios of the coefficients in the balanced chemical equation. The sign of the coefficient of X is positive when the concentration increases and negative when it decreases. We learned to approach three basic types of equilibrium problems. When given the concentrations of the reactants and products at equilibrium, we can solve for the equilibrium constant; when given the equilibrium constant and some of the concentrations involved, we can

solve for the missing concentrations; and when given the equilibrium constant and the initial concentrations, we can solve for the concentrations at equilibrium.

This page titled 12.5: Equilibrium Calculations is shared under a CC BY license and was authored, remixed, and/or curated by OpenStax.

- **13.5: Equilibrium Calculations** by OpenStax is licensed CC BY 4.0. Original source: https://openstax.org/details/books/chemistry-2e.

12.6: Fundamental Equilibrium Concepts (Exercises)

Template:HideTOC

13.1: Chemical Equilibria Exercises

Q13.1.1

What does it mean to describe a reaction as “reversible”?

S13.1.1

The reaction can proceed in both the forward and reverse directions.

Q13.1.2

When writing an equation, how is a reversible reaction distinguished from a nonreversible reaction?

Q13.1.3

If a reaction is reversible, when can it be said to have reached equilibrium?

S13.1.3

When a system has reached equilibrium, no further changes in the reactant and product concentrations occur; the reactions continue to occur, but at equivalent rates.

Q13.1.4

Is a system at equilibrium if the rate constants of the forward and reverse reactions are equal?

Q13.1.5

If the concentrations of products and reactants are equal, is the system at equilibrium?

S13.1.5

The concept of equilibrium does not imply equal concentrations, though it is possible.

13.2: Equilibrium Constant Exercises

Q13.2.1

Explain why there may be an infinite number of values for the reaction quotient of a reaction at a given temperature but there can be only one value for the equilibrium constant at that temperature.

Q13.2.2

Explain why an equilibrium between $Br_2(l)$ and $Br_2(g)$ would not be established if the container were not a closed vessel shown below:

S13.2.2

Equilibrium cannot be established between the liquid and the gas phase if the top is removed from the bottle because the system is not closed; one of the components of the equilibrium, the Br_2 vapor, would escape from the bottle until all liquid disappeared. Thus, more liquid would evaporate than can condense back from the gas phase to the liquid phase.

Q13.2.3

If you observe the following reaction at equilibrium, is it possible to tell whether the reaction started with pure NO_2 or with pure N_2O_4?

\[\ce{2NO2}(g) \rightleftharpoons \ce{N2O4}(g)\]

Q13.2.4

Among the solubility rules previously discussed is the statement: All chlorides are soluble except Hg_2Cl_2, AgCl, $PbCl_2$, and CuCl.

Q13.2.5

1. (a) Write the expression for the equilibrium constant for the reaction represented by the equation $\mathbf{AgCl}(s) \rightleftharpoons \mathbf{Ag^+}(aq) + \mathbf{Cl^-}(aq)$. Is $K_c > 1$, < 1, or ≈ 1? Explain your answer.
2. (b) Write the expression for the equilibrium constant for the reaction represented by the equation $\mathbf{Pb^{2+}}(aq) + 2\,\mathbf{Cl^-}(aq) \rightleftharpoons \mathbf{PbCl_2}(s)$. Is $K_c > 1$, < 1, or ≈ 1? Explain your answer.

S13.2.5

(a) $K_c = [Ag^+][Cl^-] < 1$. AgCl is insoluble; thus, the concentrations of ions are much less than 1 *M*; (b) $K_c = \dfrac{1}{[Pb^2+][Cl-]^2} > 1$ because $PbCl_2$ is insoluble and formation of the solid will reduce the concentration of ions to a low level (<1 *M*).

Q13.2.6

Among the solubility rules previously discussed is the statement: Carbonates, phosphates, borates, and arsenates—except those of the ammonium ion and the alkali metals—are insoluble.

a. Write the expression for the equilibrium constant for the reaction represented by the equation $\mathbf{CaCO_3}(s) \rightleftharpoons \mathbf{Ca^{2+}}(aq) + \mathbf{CO_3^-}(aq)$. Is $K_c > 1$, < 1, or ≈ 1? Explain your answer.
b. Write the expression for the equilibrium constant for the reaction represented by the equation $3\,\mathbf{Ba^{2+}}(aq) + 2\,\mathbf{PO_4^{3-}}(aq) \rightleftharpoons \mathbf{Ba_3(PO_4)_2}(s)$. Is $K_c > 1$, < 1, or ≈ 1? Explain your answer.

Q13.2.7

Benzene is one of the compounds used as octane enhancers in unleaded gasoline. It is manufactured by the catalytic conversion of acetylene to benzene: $3\,\mathbf{C_2H_2}(g) \longrightarrow \mathbf{C_6H_6}(g)$. Which value of K_c would make this reaction most useful commercially? $K_c \approx 0.01$, $K_c \approx 1$, or $K_c \approx 10$. Explain your answer.

S13.2.7

Since $K_c = \dfrac{[C6H6]}{[C2H2]^3}$, a value of $K_c \approx 10$ means that C_6H_6 predominates over C_2H_2. In such a case, the reaction would be commercially feasible if the rate to equilibrium is suitable.

Q13.2.8

Show that the complete chemical equation, the total ionic equation, and the net ionic equation for the reaction represented by the equation $\mathbf{KI}(aq) + \mathbf{I_2}(aq) \rightleftharpoons \mathbf{KI_3}(aq)$ give the same expression for the reaction quotient. KI_3 is composed of the ions K^+ and I_3^-.

Q13.2.9

For a titration to be effective, the reaction must be rapid and the yield of the reaction must essentially be 100%. Is $K_c > 1$, < 1, or ≈ 1 for a titration reaction?

S13.2.9

$K_c > 1$

Q13.2.10

For a precipitation reaction to be useful in a gravimetric analysis, the product of the reaction must be insoluble. Is $K_c > 1$, < 1, or ≈ 1 for a useful precipitation reaction?

Q13.2.11

Write the mathematical expression for the reaction quotient, Q_c, for each of the following reactions:

a. $\mathrm{CH_4}(g) + \mathrm{Cl_2}(g) \rightleftharpoons \mathrm{CH_3Cl}(g) + \mathrm{HCl}(g)$
b. $\mathrm{N_2}(g) + \mathrm{O_2}(g) \rightleftharpoons 2\,\mathrm{NO}(g)$
c. $2\,\mathrm{SO_2}(g) + \mathrm{O_2}(g) \rightleftharpoons 2\,\mathrm{SO_3}(g)$
d. $\mathrm{BaSO_3}(s) \rightleftharpoons \mathrm{BaO}(s) + \mathrm{SO_2}(g)$
e. $\mathrm{P_4}(g) + 5\,\mathrm{O_2}(g) \rightleftharpoons \mathrm{P_4O_{10}}(s)$
f. $\mathrm{Br_2}(g) \rightleftharpoons 2\,\mathrm{Br}(g)$
g. $\mathrm{CH_4}(g) + 2\,\mathrm{O_2}(g) \rightleftharpoons \mathrm{CO_2}(g) + 2\,\mathrm{H_2O}(l)$
h. $\mathrm{CuSO_4 \cdot 5\,H_2O}(s) \rightleftharpoons \mathrm{CuSO_4}(s) + 5\,\mathrm{H_2O}(g)$

S13.2.11

(a) $Q_c = \frac{[CH3Cl][HCl]}{[CH4][Cl2]}$; (b) $Q_c = \frac{[NO]^2}{[N2][O2]}$; (c) $Q_c = \frac{[SO3]^2}{[SO2]^2[O2]}$; (d) $Q_c = [\mathrm{SO_2}]$; (e) $Q_c = \frac{1}{[P4][O2]^5}$; (f) $Q_c = \frac{[Br]^2}{[Br2]}$; (g) $Q_c = \frac{[CO2]}{[CH4][O2]^2}$; (h) $Q_c = [\mathrm{H_2O}]^5$

Q13.2.12

Write the mathematical expression for the reaction quotient, Q_c, for each of the following reactions:

a. $\mathrm{N_2}(g) + 3\,\mathrm{H_2}(g) \rightleftharpoons 2\,\mathrm{NH_3}(g)$
b. $4\,\mathrm{NH_3}(g) + 5\,\mathrm{O_2}(g) \rightleftharpoons 4\,\mathrm{NO}(g) + 6\,\mathrm{H_2O}(g)$
c. $\mathrm{N_2O_4}(g) \rightleftharpoons 2\,\mathrm{NO_2}(g)$
d. $\mathrm{CO_2}(g) + \mathrm{H_2}(g) \rightleftharpoons \mathrm{CO}(g) + \mathrm{H_2O}(g)$
e. $\mathrm{NH_4Cl}(s) \rightleftharpoons \mathrm{NH_3}(g) + \mathrm{HCl}(g)$
f. $2\,\mathrm{Pb(NO_3)_2}(s) \rightleftharpoons 2\,\mathrm{PbO}(s) + 4\,\mathrm{NO_2}(g) + \mathrm{O_2}(g)$
g. $2\,\mathrm{H_2}(g) + \mathrm{O_2}(g) \rightleftharpoons 2\,\mathrm{H_2O}(l)$
h. $\mathrm{S_8}(g) \rightleftharpoons 8\,\mathrm{S}(g)$

S13.2.12

The initial concentrations or pressures of reactants and products are given for each of the following systems. Calculate the reaction quotient and determine the direction in which each system will proceed to reach equilibrium.

a. $2\,\mathrm{NH_3}(g) \rightleftharpoons \mathrm{N_2}(g) + 3\,\mathrm{H_2}(g)$ $K_c = 17$; $[\mathrm{NH_3}] = 0.20\ M$, $[\mathrm{N_2}] = 1.00\ M$, $[\mathrm{H_2}] = 1.00\ M$
b. $2\,\mathrm{NH_3}(g) \rightleftharpoons \mathrm{N_2}(g) + 3\,\mathrm{H_2}(g)$ $K_P = 6.8 \times 10^4$; initial pressures: $\mathrm{NH_3} = 3.0$ atm, $\mathrm{N_2} = 2.0$ atm, $\mathrm{H_2} = 1.0$ atm
c. $2\,\mathrm{SO_3}(g) \rightleftharpoons 2\,\mathrm{SO_2}(g) + \mathrm{O_2}(g)$ $K_c = 0.230$; $[\mathrm{SO_3}] = 0.00\ M$, $[\mathrm{SO_2}] = 1.00\ M$, $[\mathrm{O_2}] = 1.00\ M$
d. $2\,\mathrm{SO_3}(g) \rightleftharpoons 2\,\mathrm{SO_2}(g) + \mathrm{O_2}(g)$ $K_P = 16.5$; initial pressures: $\mathrm{SO_3} = 1.00$ atm, $\mathrm{SO_2} = 1.00$ atm, $\mathrm{O_2} = 1.00$ atm
e. $2\,\mathrm{NO}(g) + \mathrm{Cl_2}(g) \rightleftharpoons 2\,\mathrm{NOCl}(g)$ $K_c = 4.6 \times 10^4$; $[\mathrm{NO}] = 1.00\ M$, $[\mathrm{Cl_2}] = 1.00\ M$, $[\mathrm{NOCl}] = 0\ M$
f. $\mathrm{N_2}(g) + \mathrm{O_2}(g) \rightleftharpoons 2\,\mathrm{NO}(g)$ $K_P = 0.050$; initial pressures: $\mathrm{NO} = 10.0$ atm, $\mathrm{N_2} = \mathrm{O_2} = 5$ atm

S13.2.13

(a) Q_c 25 proceeds left; (b) Q_P 0.22 proceeds right; (c) Q_c undefined proceeds left; (d) Q_P 1.00 proceeds right; (e) Q_P 0 proceeds right; (f) Q_c 4 proceeds left

Q13.2.14

The initial concentrations or pressures of reactants and products are given for each of the following systems. Calculate the reaction quotient and determine the direction in which each system will proceed to reach equilibrium.

a. $2\,NH_3(g) \rightleftharpoons N_2(g) + 3\,H_2(g)$ $K_c = 17$; [NH_3] = 0.50 *M*, [N_2] = 0.15 *M*, [H_2] = 0.12 *M*
b. $2\,NH_3(g) \rightleftharpoons N_2(g) + 3\,H_2(g)$ $K_P = 6.8 \times 10^4$; initial pressures: NH_3 = 2.00 atm, N_2 = 10.00 atm, H_2 = 10.00 atm
c. $2\,SO_3(g) \rightleftharpoons 2\,SO_2(g) + O_2(g)$ $K_c = 0.230$; [SO_3] = 2.00 *M*, [SO_2] = 2.00 *M*, [O_2] = 2.00 *M*
d. $2\,SO_3(g) \rightleftharpoons 2\,SO_2(g) + O_2(g)$ $K_P = 6.5$ atm; initial pressures: SO_2 = 1.00 atm, O_2 = 1.130 atm, SO_3 = 0 atm
e. $2\,NO(g) + Cl_2(g) \rightleftharpoons 2\,NOCl(g)$ $K_P = 2.5 \times 10^3$; initial pressures: NO = 1.00 atm, Cl_2 = 1.00 atm, NOCl = 0 atm
f. $N_2(g) + O_2(g) \rightleftharpoons 2\,NO(g)$ $K_c = 0.050$; [N_2] = 0.100 *M*, [O_2] = 0.200 *M*, [NO] = 1.00 *M*

Q13.2.15

The following reaction has $K_P = 4.50 \times 10^{-5}$ at 720 K.

\[\ce{N2}(g)+\ce{3H2}(g) \rightleftharpoons \ce{2NH3}(g)\]

If a reaction vessel is filled with each gas to the partial pressures listed, in which direction will it shift to reach equilibrium? $P(NH_3)$ = 93 atm, $P(N_2)$ = 48 atm, and $P(H_2)$ = 52

S13.2.15

The system will shift toward the reactants to reach equilibrium.

Q13.2.16

Determine if the following system is at equilibrium. If not, in which direction will the system need to shift to reach equilibrium?

\(\ce{SO2Cl2}(g) \rightleftharpoons \ce{SO2}(g)+\ce{Cl2}(g)\)

[SO_2Cl_2] = 0.12 *M*, [Cl_2] = 0.16 *M* and [SO_2] = 0.050 *M*. K_c for the reaction is 0.078.

Q13.2.17

Which of the systems described in Exercise give homogeneous equilibria? Which give heterogeneous equilibria?

S13.2.17

(a) homogenous; (b) homogenous; (c) homogenous; (d) heterogeneous; (e) heterogeneous; (f) homogenous; (g) heterogeneous; (h) heterogeneous

Q13.2.18

Which of the systems described in Exercise give homogeneous equilibria? Which give heterogeneous equilibria?

Q13.2.19

For which of the reactions in Exercise does K_c (calculated using concentrations) equal K_P (calculated using pressures)?

S13.2.19

This situation occurs in (a) and (b).

Q13.2.19

For which of the reactions in Exercise does K_c (calculated using concentrations) equal K_P (calculated using pressures)?

Q13.2.20

Convert the values of K_c to values of K_P or the values of K_P to values of K_c.

a. $N_2(g) + 3\,H_2(g) \rightleftharpoons 2\,NH_3(g)$ $K_c = 0.50$ at 400°C
b. $H_2 + I_2 \rightleftharpoons 2\,HI$ $K_c = 50.2$ at 448°C
c. $Na_2SO_4 \cdot 10\,H_2O(s) \rightleftharpoons Na_2SO_4(s) + 10\,H_2O(g)$ $K_P = 4.08 \times 10^{-25}$ at 25°C
d. $H_2O(l) \rightleftharpoons H_2O(g)$ $K_P = 0.122$ at 50°C

S13.2.20

(a) $K_P = 1.6 \times 10^{-4}$; (b) $K_P = 50.2$; (c) $K_c = 5.31 \times 10^{-39}$; (d) $K_c = 4.60 \times 10^{-3}$

Q13.2.21

Convert the values of K_c to values of K_P or the values of K_P to values of K_c.

a. $\mathrm{Cl_2}(g) + \mathrm{Br_2}(g) \rightleftharpoons 2\,\mathrm{BrCl}(g) \quad K_c = 4.7 \times 10^{-2}$ at 25°C
b. $2\,\mathrm{SO_2}(g) + \mathrm{O_2}(g) \rightleftharpoons 2\,\mathrm{SO_3}(g) \quad K_P = 48.2$ at 500°C
c. $\mathrm{CaCl_2 \cdot 6\,H_2O}(s) \rightleftharpoons \mathrm{CaCl_2}(s) + 6\,\mathrm{H_2O}(g) \quad K_P = 5.09 \times 10^{-44}$ at 25°C
d. $\mathrm{H_2O}(l) \rightleftharpoons \mathrm{H_2O}(g) \quad K_P = 0.196$ at 60°C

Q13.2.22

What is the value of the equilibrium constant expression for the change $\mathrm{H_2O}(l) \rightleftharpoons \mathrm{H_2O}(g)$ at 30 °C?

S13.2.22

$$K_P = P_{\mathrm{H_2O}} = 0.042. \tag{12.6.1}$$

Q13.2.23

Write the expression of the reaction quotient for the ionization of HOCN in water.

Q13.2.24

Write the reaction quotient expression for the ionization of NH_3 in water.

S13.2.24

$$Q_c = \frac{[NH4+][OH-]}{[HN3]} \tag{12.6.2}$$

Q13.2.25

What is the approximate value of the equilibrium constant K_P for the change $\mathrm{C_2H_5OC_2H_5}(l) \rightleftharpoons \mathrm{C_2H_5OC_2H_5}(g)$ at 25 °C. (Vapor pressure was described in the previous chapter on liquids and solids; refer back to this chapter to find the relevant information needed to solve this problem.)

13.3: Shifting Equilbria Exercises

Q13.3.1

The following equation represents a reversible decomposition:

$$\mathrm{CaCO_3}(s) \rightleftharpoons \mathrm{CaO}(s) + \mathrm{CO_2}(g)$$

Under what conditions will decomposition in a closed container proceed to completion so that no $CaCO_3$ remains?

S13.3.1

The amount of $CaCO_3$ must be so small that $P_{\mathrm{CO_2}}$ is less than K_P when the $CaCO_3$ has completely decomposed. In other words, the starting amount of $CaCO_3$ cannot completely generate the full $P_{\mathrm{CO_2}}$ required for equilibrium.

Q13.3.2

Explain how to recognize the conditions under which changes in pressure would affect systems at equilibrium.

Q13.3.3

What property of a reaction can we use to predict the effect of a change in temperature on the value of an equilibrium constant?

S13.3.3

The change in enthalpy may be used. If the reaction is exothermic, the heat produced can be thought of as a product. If the reaction is endothermic the heat added can be thought of as a reactant. Additional heat would shift an exothermic reaction back to the

reactants but would shift an endothermic reaction to the products. Cooling an exothermic reaction causes the reaction to shift toward the product side; cooling an endothermic reaction would cause it to shift to the reactants' side.

Q13.3.4

What would happen to the color of the solution in part (b) of Figure if a small amount of NaOH were added and Fe(OH)3 precipitated? Explain your answer.

Q13.3.5

The following reaction occurs when a burner on a gas stove is lit:

\(\ce{CH4}(g)+\ce{2O2}(g)\rightleftharpoons\ce{CO2}(g)+\ce{2H2O}(g)\)

Is an equilibrium among CH_4, O_2, CO_2, and H_2O established under these conditions? Explain your answer.

S13.3.5

No, it is not at equilibrium. Because the system is not confined, products continuously escape from the region of the flame; reactants are also added continuously from the burner and surrounding atmosphere.

Q13.3.6

A necessary step in the manufacture of sulfuric acid is the formation of sulfur trioxide, SO3, from sulfur dioxide, SO2, and oxygen, O2, shown here. At high temperatures, the rate of formation of $SO_3$is higher, but the equilibrium amount (concentration or partial pressure) of SO3 is lower than it would be at lower temperatures.

$$2\,SO_2(g) + O_2(g) \longrightarrow 2\,SO_3(g) \tag{12.6.3}$$

a. (a) Does the equilibrium constant for the reaction increase, decrease, or remain about the same as the temperature increases?
b. (b) Is the reaction endothermic or exothermic?

Q13.3.7a

Suggest four ways in which the concentration of hydrazine, N_2H_4, could be increased in an equilibrium described by the following equation:

\[\ce{N2}(g)+\ce{2H2}(g)\rightleftharpoons\ce{N2H4}(g) \hspace{20px} \Delta H=\ce{95\:kJ}\]

S13.3.7a

Add N_2; add H_2; decrease the container volume; heat the mixture.

Q13.3.7b

Suggest four ways in which the concentration of PH_3 could be increased in an equilibrium described by the following equation:

$$P_4(g) + 6\,H_2(g) \rightleftharpoons 4\,PH_3(g) \quad \Delta H = 110.5\ \text{kJ} \tag{12.6.4}$$

Q13.3.8

How will an increase in temperature affect each of the following equilibria? How will a decrease in the volume of the reaction vessel affect each?

a. $2\,NH_3(g) \rightleftharpoons N_2(g) + 3\,H_2(g) \quad \Delta H = 92\ \text{kJ}$
b. $N_2(g) + O_2(g) \rightleftharpoons 2\,NO(g) \quad \Delta H = 181\ \text{kJ}$
c. $2\,O_3(g) \rightleftharpoons 3\,O_2(g) \quad \Delta H = -285\ \text{kJ}$
d. $CaO(s) + CO_2(g) \rightleftharpoons CaCO_3(s) \quad \Delta H = -176\ \text{kJ}$

S13.3.8

(a) ΔT increase = shift right, ΔP increase = shift left; (b) ΔT increase = shift right, ΔP increase = no effect; (c) ΔT increase = shift left, ΔP increase = shift left; (d) ΔT increase = shift left, ΔP increase = shift right.

Q13.3.9

How will an increase in temperature affect each of the following equilibria? How will a decrease in the volume of the reaction vessel affect each?

a. $2\,H_2O(g) \rightleftharpoons 2\,H_2(g) + O_2(g) \quad \Delta H = 484\ kJ$
b. $N_2(g) + 3\,H_2(g) \rightleftharpoons 2\,NH_3(g) \quad \Delta H = -92.2\ kJ$
c. $2\,Br(g) \rightleftharpoons Br_2(g) \quad \Delta H = -224\ kJ$
d. $H_2(g) + I_2(s) \rightleftharpoons 2\,HI(g) \quad \Delta H = 53\ kJ$

Q13.3.10

Water gas is a 1:1 mixture of carbon monoxide and hydrogen gas and is called water gas because it is formed from steam and hot carbon in the following reaction:

$$H_2O(g) + C(s) \rightleftharpoons H_2(g) + CO(g). \tag{12.6.5}$$

Methanol, a liquid fuel that could possibly replace gasoline, can be prepared from water gas and hydrogen at high temperature and pressure in the presence of a suitable catalyst.

a. Write the expression for the equilibrium constant (K_c) for the reversible reaction

$$2\,H_2(g) + CO(g) \rightleftharpoons CH_3OH(g) \quad \Delta H = -90.2\ kJ \tag{12.6.6}$$

b. What will happen to the concentrations of H_2, CO, and CH_3OH at equilibrium if more H_2 is added?
c. What will happen to the concentrations of H_2, CO, and CH_3OH at equilibrium if CO is removed?
d. What will happen to the concentrations of H_2, CO, and CH_3OH at equilibrium if CH_3OH is added?
e. What will happen to the concentrations of H_2, CO, and CH_3OH at equilibrium if the temperature of the system is increased?
f. What will happen to the concentrations of H_2, CO, and CH_3OH at equilibrium if more catalyst is added?

S13.3.10

a. $K_c = \dfrac{[CH3OH]}{[H2]^2[CO]}$;
b. $[H_2]$ increases, [CO] decreases, $[CH_3OH]$ increases;
c. $[H_2]$ increases, [CO] decreases, $[CH_3OH]$ decreases;
d. $[H_2]$ increases, [CO] increases, $[CH_3OH]$ increases;
e. $[H_2]$ increases, [CO] increases, $[CH_3OH]$ decreases;
f. no changes.

Q13.3.11

Nitrogen and oxygen react at high temperatures.

a. Write the expression for the equilibrium constant (Kc) for the reversible reaction

$$N_2(g) + O_2(g) \rightleftharpoons 2\,NO(g) \quad \Delta H = 181\ kJ \tag{12.6.7}$$

b. What will happen to the concentrations of N_2, O_2, and NO at equilibrium if more O_2 is added?
c. What will happen to the concentrations of N_2, O_2, and NO at equilibrium if N_2 is removed?
d. What will happen to the concentrations of N_2, O_2, and NO at equilibrium if NO is added?
e. What will happen to the concentrations of N_2, O_2, and NO at equilibrium if the pressure on the system is increased by reducing the volume of the reaction vessel?
f. What will happen to the concentrations of N_2, O_2, and NO at equilibrium if the temperature of the system is increased?
g. What will happen to the concentrations of N_2, O_2, and NO at equilibrium if a catalyst is added?

Q13.3.12

Water gas, a mixture of H_2 and CO, is an important industrial fuel produced by the reaction of steam with red hot coke, essentially pure carbon.

a. Write the expression for the equilibrium constant for the reversible reaction

$$\mathrm{C}(s) + \mathrm{H_2O}(g) \rightleftharpoons \mathrm{CO}(g) + \mathrm{H_2}(g) \quad \Delta H = 131.30\ \mathrm{kJ} \tag{12.6.8}$$

b. What will happen to the concentration of each reactant and product at equilibrium if more C is added?
c. What will happen to the concentration of each reactant and product at equilibrium if H_2O is removed?
d. What will happen to the concentration of each reactant and product at equilibrium if CO is added?
e. What will happen to the concentration of each reactant and product at equilibrium if the temperature of the system is increased?

S13.3.12

(a) $K_c = \frac{[CO][H2]}{[H2O]}$; (b) [$H_2O$] no change, [CO] no change, [H_2] no change; (c) [H_2O] decreases, [CO] decreases, [H_2] decreases; (d) [H_2O] increases, [CO] increases, [H_2] decreases; (f) [H_2O] decreases, [CO] increases, [H_2] increases. In (b), (c), (d), and (e), the mass of carbon will change, but its concentration (activity) will not change.

Q13.3.13

Pure iron metal can be produced by the reduction of iron(III) oxide with hydrogen gas.

a. Write the expression for the equilibrium constant (K_c) for the reversible reaction

$$\mathrm{Fe_2O_3}(s) + 3\,\mathrm{H_2}(g) \rightleftharpoons 2\,\mathrm{Fe}(s) + 3\,\mathrm{H_2O}(g) \quad \Delta H = 98.7\ \mathrm{kJ} \tag{12.6.9}$$

b. What will happen to the concentration of each reactant and product at equilibrium if more Fe is added?
c. What will happen to the concentration of each reactant and product at equilibrium if H_2O is removed?
d. What will happen to the concentration of each reactant and product at equilibrium if H_2 is added?
e. What will happen to the concentration of each reactant and product at equilibrium if the pressure on the system is increased by reducing the volume of the reaction vessel?
f. What will happen to the concentration of each reactant and product at equilibrium if the temperature of the system is increased?

Q13.3.14

Ammonia is a weak base that reacts with water according to this equation:

\[\ce{NH3}(aq)+\ce{H2O}(l)\rightleftharpoons\ce{NH4+}(aq)+\ce{OH-}(aq)\]

Will any of the following increase the percent of ammonia that is converted to the ammonium ion in water and why?

a. Addition of NaOH
b. Addition of HCl
c. Addition of NH_4Cl

S13.3.14

Only (b)

Q13.3.15

Acetic acid is a weak acid that reacts with water according to this equation:

\[\ce{CH3CO2H}(aq)+\ce{H2O}(aq)\rightleftharpoons\ce{H3O+}(aq)+\ce{CH3CO2-}(aq)\]

Will any of the following increase the percent of acetic acid that reacts and produces $\mathrm{CH_3CO_2^-}$ ion?

a. Addition of HCl
b. Addition of NaOH
c. Addition of $NaCH_3CO_2$

Q13.3.16

Suggest two ways in which the equilibrium concentration of Ag+ can be reduced in a solution of Na^+, Cl^-, Ag^+, and $\mathrm{NO_3^-}$, in contact with solid AgCl.

\(\ce{Na+}(aq)+\ce{Cl-}(aq)+\ce{Ag+}(aq)+\ce{NO3-}(aq)\rightleftharpoons\ce{AgCl}(s)+\ce{Na+}(aq)+\ce{NO3-}(aq)\)

$$\Delta H = -65.9\ \mathrm{kJ}$$

S13.3.16

Add NaCl or some other salt that produces Cl^- to the solution. Cooling the solution forces the equilibrium to the right, precipitating more AgCl(s).

Q13.3.17

How can the pressure of water vapor be increased in the following equilibrium?

\[\ce{H2O}(l)\rightleftharpoons\ce{H2O}(g) \hspace{20px} ΔH=\ce{41\:kJ}\]

Q13.3.18

Additional solid silver sulfate, a slightly soluble solid, is added to a solution of silver ion and sulfate ion at equilibrium with solid silver sulfate.

\[\ce{2Ag+}(aq)+\ce{SO4^2-}(aq)\rightleftharpoons\ce{Ag2SO4}(s)\]

Which of the following will occur?

a. Ag^+ or SO_4^{2-} concentrations will not change.
b. The added silver sulfate will dissolve.
c. Additional silver sulfate will form and precipitate from solution as Ag^+ ions and SO_4^{2-} ions combine.
d. The Ag^+ ion concentration will increase and the SO_4^{2-} ion concentration will decrease.

S13.3.18

(a)

Q13.3.19

The amino acid alanine has two isomers, α-alanine and β-alanine. When equal masses of these two compounds are dissolved in equal amounts of a solvent, the solution of α-alanine freezes at the lowest temperature. Which form, α-alanine or β-alanine, has the larger equilibrium constant for ionization ($HX \rightleftharpoons H^+ + X^-$)?

13.4: Equilibrium Calculations Exercises

Q13.4.1

A reaction is represented by this equation: $A(aq) + 2\,B(aq) \rightleftharpoons 2\,C(aq) \quad K_c = 1 \times 10^3$

a. Write the mathematical expression for the equilibrium constant.
b. Using concentrations ≤1 *M*, make up two sets of concentrations that describe a mixture of A, B, and C at equilibrium.

S13.4.1

$K_c = \frac{[C]^2}{[A][B]^2}$. [A] = 0.1 *M*, [B] = 0.1 *M*, [C] = 1 *M*; and [A] = 0.01, [B] = 0.250, [C] = 0.791.

Q13.4.2

A reaction is represented by this equation: $2\,W(aq) \rightleftharpoons X(aq) + 2\,Y(aq) \quad K_c = 5 \times 10^{-4}$

a. Write the mathematical expression for the equilibrium constant.
b. Using concentrations of ≤1 *M*, make up two sets of concentrations that describe a mixture of W, X, and Y at equilibrium.

Q13.4.3

What is the value of the equilibrium constant at 500 °C for the formation of NH_3 according to the following equation?

$$N_2(g) + 3\,H_2(g) \rightleftharpoons 2\,NH_3(g) \tag{12.6.10}$$

An equilibrium mixture of $NH_3(g)$, $H_2(g)$, and $N_2(g)$ at 500 °C was found to contain 1.35 *M* H_2, 1.15 *M* N_2, and 4.12×10^{-1} *M* NH_3.

S13.4.3

$K_c = 6.00 \times 10^{-2}$

Q13.4.4

Hydrogen is prepared commercially by the reaction of methane and water vapor at elevated temperatures.

$$\mathrm{CH_4}(g) + \mathrm{H_2O}(g) \rightleftharpoons 3\,\mathrm{H_2}(g) + \mathrm{CO}(g) \tag{12.6.11}$$

What is the equilibrium constant for the reaction if a mixture at equilibrium contains gases with the following concentrations: CH_4, 0.126 *M*; H_2O, 0.242 *M*; CO, 0.126 *M*; H_2 1.15 *M*, at a temperature of 760 °C?

A 0.72-mol sample of PCl_5 is put into a 1.00-L vessel and heated. At equilibrium, the vessel contains 0.40 mol of $PCl_3(g)$ and 0.40 mol of $Cl_2(g)$. Calculate the value of the equilibrium constant for the decomposition of PCl_5 to PCl_3 and Cl_2 at this temperature.

S13.4.4

$K_c = 0.50$

Q13.4.5

At 1 atm and 25 °C, NO_2 with an initial concentration of 1.00 *M* is 3.3×10^{-3}% decomposed into NO and O_2. Calculate the value of the equilibrium constant for the reaction.

$$2\,\mathrm{NO_2}(g) \rightleftharpoons 2\,\mathrm{NO}(g) + \mathrm{O_2}(g) \tag{12.6.12}$$

Q13.4.6

Calculate the value of the equilibrium constant K_P for the reaction $2\,\mathrm{NO}(g) + \mathrm{Cl_2}(g) \rightleftharpoons 2\,\mathrm{NOCl}(g)$ from these equilibrium pressures: NO, 0.050 atm; Cl_2, 0.30 atm; NOCl, 1.2 atm.

S13.4.6

The equilibrium equation is $K_P = 1.9 \times 10^3$

Q13.4.7

When heated, iodine vapor dissociates according to this equation:

$$\mathrm{I_2}(g) \rightleftharpoons 2\,\mathrm{I}(g) \tag{12.6.13}$$

At 1274 K, a sample exhibits a partial pressure of I_2 of 0.1122 atm and a partial pressure due to I atoms of 0.1378 atm. Determine the value of the equilibrium constant, K_P, for the decomposition at 1274 K.

Q13.4.8

A sample of ammonium chloride was heated in a closed container.

$$\mathrm{NH_4Cl}(s) \rightleftharpoons \mathrm{NH_3}(g) + \mathrm{HCl}(g) \tag{12.6.14}$$

At equilibrium, the pressure of $NH_3(g)$ was found to be 1.75 atm. What is the value of the equilibrium constant K_P for the decomposition at this temperature?

S13.4.8

$K_P = 3.06$

Q13.4.9

At a temperature of 60 °C, the vapor pressure of water is 0.196 atm. What is the value of the equilibrium constant K_P for the transformation at 60 °C?

$$\mathrm{H_2O}(l) \rightleftharpoons \mathrm{H_2O}(g) \tag{12.6.15}$$

Q13.4.10

Complete the changes in concentrations (or pressure, if requested) for each of the following reactions.

(a)

$$2\,SO_3(g) \rightleftharpoons 2\,SO_2(g) + O_2(g) \quad (12.6.16)$$
$$\_\_\_\_ \quad \_\_\_\_ \quad +x \quad (12.6.17)$$
$$\_\_\_\_ \quad \_\_\_\_ \quad 0.125\ M \quad (12.6.18)$$

(b)

$$4\,NH_3(g) + 3\,O_2(g) \rightleftharpoons 2\,N_2(g) + 6\,H_2O(g) \quad (12.6.19)$$
$$\_\_\_\_ \quad 3x \quad \_\_\_\_ \quad \_\_\_\_ \quad (12.6.20)$$
$$\_\_\_\_ \quad 0.24\ M \quad \_\_\_\_ \quad \_\_\_\_ \quad (12.6.21)$$

(c) Change in pressure:

$$2\,CH_4(g) \rightleftharpoons C_2H_2(g) + 3\,H_2(g) \quad (12.6.22)$$
$$\_\_\_\_ \quad x \quad \_\_\_\_ \quad (12.6.23)$$
$$\_\_\_\_ \quad 25\ \text{torr} \quad \_\_\_\_ \quad (12.6.24)$$

(d) Change in pressure:

$$CH_4(g) + H_2O(g) \rightleftharpoons CO(g) + 3\,H_2(g) \quad (12.6.25)$$
$$\_\_\_\_ \quad x \quad \_\_\_\_ \quad \_\_\_\_ \quad (12.6.26)$$
$$\_\_\_\_ \quad 5\ \text{atm} \quad \_\_\_\_ \quad \_\_\_\_ \quad (12.6.27)$$

(e)

$$NH_4Cl(s) \rightleftharpoons NH_3(g) + HCl(g) \quad (12.6.28)$$
$$x \quad \_\_\_\_ \quad (12.6.29)$$
$$1.03 \times 10^{-4}\ M \quad \_\_\_\_ \quad (12.6.30)$$

(f) change in pressure:

$$Ni(s) + 4\,CO(g) \rightleftharpoons Ni(CO)_4(g) \quad (12.6.31)$$
$$4x \quad \_\_\_\_ \quad (12.6.32)$$
$$0.40\ \text{atm} \quad \_\_\_\_ \quad (12.6.33)$$

S13.4.10

a. $-2x$, $2x$, $-0.250\ M$, $0.250\ M$;
b. $4x$, $-2x$, $-6x$, $0.32\ M$, $-0.16\ M$, $-0.48\ M$;
c. $-2x$, $3x$, -50 torr, 75 torr;
d. x, $-x$, $-3x$, 5 atm, -5 atm, -15 atm;
e. x, $1.03 \times 10^{-4}\ M$; (f) x, 0.1 atm.

Q13.4.11

Complete the changes in concentrations (or pressure, if requested) for each of the following reactions.

(a)

$$2\,H_2(g) + O_2(g) \rightleftharpoons 2\,H_2O(g) \quad (12.6.34)$$
$$\_\_\_\_ \quad \_\_\_\_ \quad +2x \quad (12.6.35)$$
$$\_\_\_\_ \quad \_\_\_\_ \quad 1.50\ M \quad (12.6.36)$$

(b)

$$CS_2(g) + 4\,H_2(g) \rightleftharpoons CH_4(g) + 2\,H_2S(g) \quad (12.6.37)$$
$$x \quad \_\_\_\_ \quad \_\_\_\_ \quad \_\_\_\_ \quad (12.6.38)$$
$$0.020\ M \quad \_\_\_\_ \quad \_\_\_\_ \quad \_\_\_\_ \quad (12.6.39)$$

(c) Change in pressure:

$$H_2(g) + Cl_2(g) \rightleftharpoons 2\,HCl(g) \quad (12.6.40)$$
$$x \quad \_\_\_\_ \quad \_\_\_\_ \quad (12.6.41)$$
$$1.50\ \text{atm} \quad \_\_\_\_ \quad \_\_\_\_ \quad (12.6.42)$$

(d) Change in pressure:

$$2\,NH_3(g) + 2\,O_2(g) \rightleftharpoons N_2O(g) + 3\,H_2O(g) \quad (12.6.43)$$
$$\_\_\_\_ \quad \_\_\_\_ \quad \_\_\_\_ \quad x \quad (12.6.44)$$
$$\_\_\_\_ \quad \_\_\_\_ \quad \_\_\_\_ \quad 60.6\ \text{torr} \quad (12.6.45)$$

(e)

$$NH_4HS(s) \rightleftharpoons NH_3(g) + H_2S(g) \quad (12.6.46)$$
$$x \quad \_\_\_\_ \quad (12.6.47)$$
$$9.8 \times 10^{-6}\ M \quad \_\_\_\_ \quad (12.6.48)$$

(f) Change in pressure:

$$Fe(s) + 5\,CO(g) \rightleftharpoons Fe(CO)_4(g) \quad (12.6.49)$$
$$\_\_\_\_ \quad x \quad (12.6.50)$$
$$\_\_\_\_ \quad 0.012\ \text{atm} \quad (12.6.51)$$

Q13.4.12

Why are there no changes specified for Ni in Exercise, part (f)? What property of Ni does change?

S13.4.12

Activities of pure crystalline solids equal 1 and are constant; however, the mass of Ni does change.

Q13.4.13

Why are there no changes specified for NH_4HS in Exercise, part (e)? What property of NH_4HS does change?

Q13.4.14

Analysis of the gases in a sealed reaction vessel containing NH_3, N_2, and H_2 at equilibrium at 400 °C established the concentration of N_2 to be 1.2 *M* and the concentration of H_2 to be 0.24 *M*.

$$N_2(g) + 3\,H_2(g) \rightleftharpoons 2\,NH_3(g) \quad K_c = 0.50 \text{ at } 400\ ^\circ\text{C} \quad (12.6.52)$$

Calculate the equilibrium molar concentration of NH_3.

S13.4.14

$[NH_3] = 9.1 \times 10^{-2}\ M$

Q13.4.16

Calculate the number of moles of HI that are at equilibrium with 1.25 mol of H_2 and 1.25 mol of I_2 in a 5.00−L flask at 448 °C.

$$H_2 + I_2 \rightleftharpoons 2\,HI \quad K_c = 50.2 \text{ at } 448\ ^\circ\text{C}$$

Q13.4.17

What is the pressure of BrCl in an equilibrium mixture of Cl_2, Br_2, and BrCl if the pressure of Cl_2 in the mixture is 0.115 atm and the pressure of Br_2 in the mixture is 0.450 atm?

$$Cl_2(g) + Br_2(g) \rightleftharpoons 2\,BrCl(g) \quad K_P = 4.7 \times 10^{-2} \quad (12.6.53)$$

S13.4.17

$P_{BrCl} = 4.9 \times 10^{-2}$ atm

Q13.4.18

What is the pressure of CO_2 in a mixture at equilibrium that contains 0.50 atm H_2, 2.0 atm of H_2O, and 1.0 atm of CO at 990 °C?

$$H_2(g) + CO_2(g) \rightleftharpoons H_2O(g) + CO(g) \quad K_P = 1.6 \text{ at } 990\ ^\circ\text{C} \quad (12.6.54)$$

Q13.4.12

Cobalt metal can be prepared by reducing cobalt(II) oxide with carbon monoxide.

$$CoO(s) + CO(g) \rightleftharpoons Co(s) + CO_2(g) \quad K_c = 4.90 \times 10^2 \text{ at } 550\ ^\circ\text{C}$$

What concentration of CO remains in an equilibrium mixture with [CO_2] = 0.100 *M*?

S13.4.12

[CO] = 2.0×10^{-4} *M*

Q13.4.13

Carbon reacts with water vapor at elevated temperatures.

$$\mathrm{C}(s) + \mathrm{H_2O}(g) \rightleftharpoons \mathrm{CO}(g) + \mathrm{H_2}(g) \quad K_c = 0.2 \text{ at } 1000\ ^\circ\mathrm{C}$$

What is the concentration of CO in an equilibrium mixture with [H_2O] = 0.500 *M* at 1000 °C?

Q13.4.14

Sodium sulfate 10−hydrate, $\mathrm{Na_2SO_4 \cdot 10\,H_2O}$, dehydrates according to the equation

$$\mathrm{Na_2SO_4 \cdot 10\,H_2O}(s) \rightleftharpoons \mathrm{Na_2SO_4}(s) + \mathrm{10\,H_2O}(g) \tag{12.6.55}$$

with $K_p = 4.08 \times 10^{-25}$ at 25°C. What is the pressure of water vapor at equilibrium with a mixture of $\mathrm{Na_2SO_4 \cdot 10\,H_2O}$ and $\mathrm{NaSO_4}$?

S13.4.14

$P_{\mathrm{H_2O}} = 3.64 \times 10^{-3}$ atm

Q13.4.15

Calcium chloride 6−hydrate, $CaCl_2 \cdot 6H_2O$, dehydrates according to the equation

$$\mathrm{CaCl_2 \cdot 6\,H_2O}(s) \rightleftharpoons \mathrm{CaCl_2}(s) + \mathrm{6\,H_2O}(g) \quad K_P = 5.09 \times 10^{-44} \text{ at } 25\ ^\circ\mathrm{C}$$

What is the pressure of water vapor at equilibrium with a mixture of $CaCl_2 \cdot 6H_2O$ and $CaCl_2$?

Q13.4.16

A student solved the following problem and found the equilibrium concentrations to be [SO_2] = 0.590 *M*, [O_2] = 0.0450 *M*, and [SO_3] = 0.260 *M*. How could this student check the work without reworking the problem? The problem was: For the following reaction at 600 °C:

$$2\,\mathrm{SO_2}(g) + \mathrm{O_2}(g) \rightleftharpoons 2\,\mathrm{SO_3}(g) \quad K_c = 4.32$$

What are the equilibrium concentrations of all species in a mixture that was prepared with [SO_3] = 0.500 *M*, [SO_2] = 0 *M*, and [O_2] = 0.350 *M*?

S13.4.16

Calculate *Q* based on the calculated concentrations and see if it is equal to K_c. Because *Q* does equal 4.32, the system must be at equilibrium.

Q13.4.16

A student solved the following problem and found [N_2O_4] = 0.16 *M* at equilibrium. How could this student recognize that the answer was wrong without reworking the problem? The problem was: What is the equilibrium concentration of N_2O_4 in a mixture formed from a sample of NO_2 with a concentration of 0.10 *M*?

$$2\,\mathrm{NO_2}(g) \rightleftharpoons \mathrm{N_2O_4}(g) \quad K_c = 160 \tag{12.6.56}$$

Assume that the change in concentration of N_2O_4 is small enough to be neglected in the following problem.

(a) Calculate the equilibrium concentration of both species in 1.00 L of a solution prepared from 0.129 mol of N_2O_4 with chloroform as the solvent.

$$\mathrm{N_2O_4}(g) \rightleftharpoons 2\,\mathrm{NO_2}(g) \quad K_c = 1.07 \times 10^{-5} \text{ in chloroform}$$

(b) Show that the change is small enough to be neglected.

S13.4.16

(a)

- $[NO_2] = 1.17 \times 10^{-3}\ M$
- $[N_2O_4] = 0.128\ M$

(b) Percent error $= \dfrac{5.87 \times 10^{-4}}{0.129} \times 100\% = 0.455\%$. The change in concentration of N_2O_4 is far less than the 5% maximum allowed.

Q13.4.17

Assume that the change in concentration of $COCl_2$ is small enough to be neglected in the following problem.

a. Calculate the equilibrium concentration of all species in an equilibrium mixture that results from the decomposition of $COCl_2$ with an initial concentration of 0.3166 *M*.

$$\mathrm{COCl_2}(g) \rightleftharpoons \mathrm{CO}(g) + \mathrm{Cl_2}(g) \quad K_c = 2.2 \times 10^{-10} \tag{12.6.57}$$

b. Show that the change is small enough to be neglected.

Q13.4.18

Assume that the change in pressure of H_2S is small enough to be neglected in the following problem.

(a) Calculate the equilibrium pressures of all species in an equilibrium mixture that results from the decomposition of H_2S with an initial pressure of 0.824 atm.

$$2\,\mathrm{H_2S}(g) \rightleftharpoons 2\,\mathrm{H_2}(g) + \mathrm{S_2}(g) \quad K_P = 2.2 \times 10^{-6}$$

(b) Show that the change is small enough to be neglected.

S13.4.18

(a)

- $[H_2S] = 0.810$ atm
- $[H_2] = 0.014$ atm
- $S_2] = 0.0072$ atm

(b) The 2*x* is dropped from the equilibrium calculation because 0.014 is negligible when subtracted from 0.824. The percent error associated with ignoring 2*x* is $\dfrac{0.014}{0.824} \times 100\% = 1.7\%$, which is less than allowed by the "5% test." The error is, indeed, negligible.

Q13.4.19

What are all concentrations after a mixture that contains $[H_2O] = 1.00\ M$ and $[Cl_2O] = 1.00\ M$ comes to equilibrium at 25 °C?

$$\mathrm{H_2O}(g) + \mathrm{Cl_2O}(g) \rightleftharpoons 2\,\mathrm{HOCl}(g) \quad K_c = 0.0900 \tag{12.6.58}$$

Q13.4.20

What are the concentrations of PCl_5, PCl_3, and Cl_2 in an equilibrium mixture produced by the decomposition of a sample of pure PCl_5 with $[PCl_5] = 2.00\ M$?

$$\mathrm{PCl_5}(g) \rightleftharpoons \mathrm{PCl_3}(g) + \mathrm{Cl_2}(g) \quad K_c = 0.0211 \tag{12.6.59}$$

S13.4.20

$[PCl_3] = 1.80\ M$; $[PC_3] = 0.195\ M$; $[PCl_3] = 0.195\ M$.

Q13.4.21

Calculate the pressures of all species at equilibrium in a mixture of NOCl, NO, and Cl_2 produced when a sample of NOCl with a pressure of 10.0 atm comes to equilibrium according to this reaction:

$$2\,\mathrm{NOCl}(g) \rightleftharpoons 2\,\mathrm{NO}(g) + \mathrm{Cl_2}(g) \quad K_P = 4.0 \times 10^{-4} \tag{12.6.60}$$

Q13.4.22

Calculate the equilibrium concentrations of NO, O_2, and NO_2 in a mixture at 250 °C that results from the reaction of 0.20 *M* NO and 0.10 *M* O_2. (Hint: *K* is large; assume the reaction goes to completion then comes back to equilibrium.)

$$2\,NO(g) + O_2(g) \rightleftharpoons 2\,NO_2(g) \quad K_c = 2.3 \times 10^5 \text{ at } 250\ ^\circ C \tag{12.6.61}$$

S13.4.22

- $[NO_2]$ = 0.19 *M*
- [NO] = 0.0070 *M*
- $[O_2]$ = 0.0035 *M*

Q13.4.23

Calculate the equilibrium concentrations that result when 0.25 *M* O_2 and 1.0 *M* HCl react and come to equilibrium.

$$4\,HCl(g) + O_2(g) \rightleftharpoons 2\,Cl_2(g) + 2\,H_2O(g) \quad K_c = 3.1 \times 10^{13} \tag{12.6.62}$$

Q13.4.24

One of the important reactions in the formation of smog is represented by the equation

$$O_3(g) + NO(g) \rightleftharpoons NO_2(g) + O_2(g) \quad K_P = 6.0 \times 10^{34} \tag{12.6.63}$$

What is the pressure of O_3 remaining after a mixture of O_3 with a pressure of 1.2×10^{-8} atm and NO with a pressure of 1.2×10^{-8} atm comes to equilibrium? (Hint: K_P is large; assume the reaction goes to completion then comes back to equilibrium.)

S13.4.24

$P_{O_3} = 4.9 \times 10^{-26}$ atm

Q13.4.24

Calculate the pressures of NO, Cl_2, and NOCl in an equilibrium mixture produced by the reaction of a starting mixture with 4.0 atm NO and 2.0 atm Cl_2. (Hint: K_P is small; assume the reverse reaction goes to completion then comes back to equilibrium.)

$$2\,NO(g) + Cl_2(g) \rightleftharpoons 2\,NOCl(g) \quad K_P = 2.5 \times 10^3$$

Q13.4.25

Calculate the number of grams of HI that are at equilibrium with 1.25 mol of H_2 and 63.5 g of iodine at 448 °C.

$$H_2 + I_2 \rightleftharpoons 2\,HI \quad K_c = 50.2 \text{ at } 448\ ^\circ C$$

S13.4.25

507 g

Q13.4.26

Butane exists as two isomers, *n*−butane and isobutane.

Three Lewis structures are shown. The first is labeled, “n dash Butane,” and has a C H subscript 3 single bonded to a C H subscript 2 group. This C H subscript 2 group is single bonded to another C H subscript 2 group which is single bonded to a C H subscript 3 group. The second is labeled, “iso dash Butane,” and is composed of a C H group single bonded to three C H subscript 3 groups. The third structure shows a chain of atoms: “C H subscript 3, C H subscript 2, C H subscript 2, C H subscript 3,” a double-headed arrow, then a carbon atom single bonded to three C H subscript 3 groups as well as a hydrogen atom.

K_P = 2.5 at 25 °C

What is the pressure of isobutane in a container of the two isomers at equilibrium with a total pressure of 1.22 atm?

Q13.4.27

What is the minimum mass of $CaCO_3$ required to establish equilibrium at a certain temperature in a 6.50-L container if the equilibrium constant (K_c) is 0.050 for the decomposition reaction of $CaCO_3$ at that temperature?

$$CaCO_3(s) \rightleftharpoons CaO(s) + CO_2(g)$$

S13.4.27

330 g

Q13.4.28

The equilibrium constant (K_c) for this reaction is 1.60 at 990 °C:

$$\mathrm{H_2}(g) + \mathrm{CO_2}(g) \rightleftharpoons \mathrm{H_2O}(g) + \mathrm{CO}(g) \tag{12.6.64}$$

Calculate the number of moles of each component in the final equilibrium mixture obtained from adding 1.00 mol of H_2, 2.00 mol of CO_2, 0.750 mol of H_2O, and 1.00 mol of CO to a 5.00-L container at 990 °C.

Q13.4.29

At 25 °C and at 1 atm, the partial pressures in an equilibrium mixture of N_2O_4 and NO_2 are $P_{\mathrm{N_2O_4}} = 0.70\ \mathrm{atm}$ and $P_{\mathrm{NO_2}} = 0.30\ \mathrm{atm}$.

a. Predict how the pressures of NO_2 and N_2O_4 will change if the total pressure increases to 9.0 atm. Will they increase, decrease, or remain the same?
b. Calculate the partial pressures of NO_2 and N_2O_4 when they are at equilibrium at 9.0 atm and 25 °C.

S13.4.29

(a) Both gases must increase in pressure.

(b) $P_{\mathrm{N_2O_4}} = 8.0\ \mathrm{atm}$ and $P_{\mathrm{NO_2}} = 1.0\ \mathrm{atm}$

Q13.4.30

In a 3.0-L vessel, the following equilibrium partial pressures are measured: N_2, 190 torr; H_2, 317 torr; NH_3, 1.00×10^3 torr.

$$\mathrm{N_2}(g) + 3\,\mathrm{H_2}(g) \rightleftharpoons 2\,\mathrm{NH_3}(g) \tag{12.6.65}$$

a. How will the partial pressures of H_2, N_2, and NH_3 change if H_2 is removed from the system? Will they increase, decrease, or remain the same?
b. Hydrogen is removed from the vessel until the partial pressure of nitrogen, at equilibrium, is 250 torr. Calculate the partial pressures of the other substances under the new conditions.

Q13.4.31

The equilibrium constant (K_c) for this reaction is 5.0 at a given temperature.

\[\ce{CO}(g)+\ce{H2O}(g) <=> \ce{CO2}(g)+\ce{H2}(g)\)]

a. On analysis, an equilibrium mixture of the substances present at the given temperature was found to contain 0.20 mol of CO, 0.30 mol of water vapor, and 0.90 mol of H_2 in a liter. How many moles of CO_2 were there in the equilibrium mixture?
b. Maintaining the same temperature, additional H_2 was added to the system, and some water vapor was removed by drying. A new equilibrium mixture was thereby established containing 0.40 mol of CO, 0.30 mol of water vapor, and 1.2 mol of H_2 in a liter. How many moles of CO_2 were in the new equilibrium mixture? Compare this with the quantity in part (a), and discuss whether the second value is reasonable. Explain how it is possible for the water vapor concentration to be the same in the two equilibrium solutions even though some vapor was removed before the second equilibrium was established.

S13.4.31

(a) 0.33 mol.

(b) $[CO]^2 = 0.50\ M$ Added H_2 forms some water to compensate for the removal of water vapor and as a result of a shift to the left after H_2 is added.

Q13.4.32a

Antimony pentachloride decomposes according to this equation:

$$\mathrm{SbCl_5}(g) \rightleftharpoons \mathrm{SbCl_3}(g) + \mathrm{Cl_2}(g)$$

An equilibrium mixture in a 5.00-L flask at 448 °C contains 3.85 g of $SbCl_5$, 9.14 g of $SbCl_3$, and 2.84 g of Cl_2. How many grams of each will be found if the mixture is transferred into a 2.00-L flask at the same temperature?

Q13.4.32b

Consider the reaction between H_2 and O_2 at 1000 K

$$\ce{2H2}(g)+\ce{O2}(g)⇌\ce{2H2O}(g) \hspace{20px} K_P=\dfrac{(P_{\ce{H2O}})^2}{(P_{\ce{O2}})(P_{\ce{H2}})^3}=1.33×10^{20}$$

If 0.500 atm of H_2 and 0.500 atm of O_2 are allowed to come to equilibrium at this temperature, what are the partial pressures of the components?

S13.4.32b

$P_{H_2} = 8.64 \times 10^{-11}$ atm

$P_{\ce{O2}}=0.250\:\ce{atm}$

$P_{\ce{H2O}}=0.500\:\ce{atm}$

Q13.4.33

An equilibrium is established according to the following equation

$$\begin{aligned} &\mathrm{Hg_2^{2+}}(aq) + \mathrm{NO_3^-}(aq) + 3\,\mathrm{H^+}(aq) \\ &\rightleftharpoons 2\,\mathrm{Hg^{2+}}(aq) + \mathrm{HNO_2}(aq) + \mathrm{H_2O}(l) \quad K_c = 4.6 \end{aligned} \tag{12.6.66}$$

What will happen in a solution that is 0.20 *M* each in Hg_2^{2+}, NO_3^-, H^+, Hg^{2+}, and HNO_2?

a. Hg_2^{2+} will be oxidized and NO_3^- reduced.
b. Hg_2^{2+} will be reduced and NO_3^- oxidized.
c. Hg^{2+} will be oxidized and HNO_2 reduced.
d. Hg^{2+} will be reduced and HNO_2 oxidized.
e. There will be no change because all reactants and products have an activity of 1.

Q13.4.34

Consider the equilibrium

$$4\,\mathrm{NO_2}(g) + 6\,\mathrm{H_2O}(g) \rightleftharpoons 4\,\mathrm{NH_3}(g) + 7\,\mathrm{O_2}(g) \tag{12.6.67}$$

a. What is the expression for the equilibrium constant (K_c) of the reaction?
b. How must the concentration of NH_3 change to reach equilibrium if the reaction quotient is less than the equilibrium constant?
c. If the reaction were at equilibrium, how would a decrease in pressure (from an increase in the volume of the reaction vessel) affect the pressure of NO_2?
d. If the change in the pressure of NO_2 is 28 torr as a mixture of the four gases reaches equilibrium, how much will the pressure of O_2 change?

S13.4.34

(a) $K_c = \dfrac{[NH3]^4[O2]^7}{[NO2]^4[H2O]^6}$. (b) [$NH_3$] must increase for Q_c to reach K_c. (c) That decrease in pressure would decrease [NO_2]. (d) $P_{O_2} = 49$ torr

Q13.4.35

The binding of oxygen by hemoglobin (Hb), giving oxyhemoglobin (HbO_2), is partially regulated by the concentration of H_3O^+ and dissolved CO_2 in the blood. Although the equilibrium is complicated, it can be summarized as

$$\mathrm{HbO_2}(aq) + \mathrm{H_3O^+}(aq) + \mathrm{CO_2}(g) \rightleftharpoons \mathrm{CO_2{-}Hb{-}H^+} + \mathrm{O_2}(g) + \mathrm{H_2O}(l)$$

1. (a) Write the equilibrium constant expression for this reaction.

2. (b) Explain why the production of lactic acid and CO_2 in a muscle during exertion stimulates release of O_2 from the oxyhemoglobin in the blood passing through the muscle.

Q13.4.36

The hydrolysis of the sugar sucrose to the sugars glucose and fructose follows a first-order rate equation for the disappearance of sucrose.

$$\mathrm{C_{12}H_{22}O_{11}}(aq) + \mathrm{H_2O}(l) \longrightarrow \mathrm{C_6H_{12}O_6}(aq) + \mathrm{C_6H_{12}O_6}(aq)$$

Rate = $k[C_{12}H_{22}O_{11}]$

In neutral solution, $k = 2.1 \times 10^{-11}$/s at 27 °C. (As indicated by the rate constant, this is a very slow reaction. In the human body, the rate of this reaction is sped up by a type of catalyst called an enzyme.) (Note: That is not a mistake in the equation—the products of the reaction, glucose and fructose, have the same molecular formulas, $C_6H_{12}O_6$, but differ in the arrangement of the atoms in their molecules). The equilibrium constant for the reaction is 1.36×10^5 at 27 °C. What are the concentrations of glucose, fructose, and sucrose after a 0.150 *M* aqueous solution of sucrose has reached equilibrium? Remember that the activity of a solvent (the effective concentration) is 1.

S13.4.36

[fructose] = 0.15 *M*

Q13.4.37

The density of trifluoroacetic acid vapor was determined at 118.1 °C and 468.5 torr, and found to be 2.784 g/L. Calculate K_c for the association of the acid.

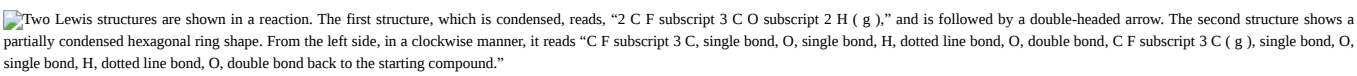

Liquid N_2O_3 is dark blue at low temperatures, but the color fades and becomes greenish at higher temperatures as the compound decomposes to NO and NO_2. At 25 °C, a value of $K_P = 1.91$ has been established for this decomposition. If 0.236 moles of N_2O_3 are placed in a 1.52-L vessel at 25 °C, calculate the equilibrium partial pressures of $N_2O_3(g)$, $NO_2(g)$, and $NO(g)$.

S13.4.37

$$P_{\mathrm{N_2O_3}} = 1.90 \text{ atm and } P_{\mathrm{NO}} = P_{\mathrm{NO_2}} = 1.90 \text{ atm}$$

Q13.4.38

A 1.00-L vessel at 400 °C contains the following equilibrium concentrations: N_2, 1.00 *M*; H_2, 0.50 *M*; and NH_3, 0.25 *M*. How many moles of hydrogen must be removed from the vessel to increase the concentration of nitrogen to 1.1 *M*?

Q13.4.39

A 0.010 *M* solution of the weak acid HA has an osmotic pressure (see chapter on solutions and colloids) of 0.293 atm at 25 °C. A 0.010 *M* solution of the weak acid HB has an osmotic pressure of 0.345 atm under the same conditions.

(a) Which acid has the larger equilibrium constant for ionization

HA [$\mathrm{HA}(aq) \rightleftharpoons \mathrm{A^-}(aq) + \mathrm{H^+}(aq)$] or HB [$\mathrm{HB}(aq) \rightleftharpoons \mathrm{H^+}(aq) + \mathrm{B^-}(aq)$]?

(b) What are the equilibrium constants for the ionization of these acids?

(Hint: Remember that each solution contains three dissolved species: the weak acid (HA or HB), the conjugate base (A^- or B^-), and the hydrogen ion (H^+). Remember that osmotic pressure (like all colligative properties) is related to the total number of solute particles. Specifically for osmotic pressure, those concentrations are described by molarities.)

S13.4.39

(a) HB ionizes to a greater degree and has the larger K_c.

(b) $K_c(HA) = 5 \times 10^{-4}$

$K_c(\text{HB}) = 3 \times 10^{-3}$

This page titled 12.6: Fundamental Equilibrium Concepts (Exercises) is shared under a CC BY license and was authored, remixed, and/or curated by OpenStax.

CHAPTER OVERVIEW

13: Acid-Base Equilibria

A general chemistry Libretexts Textmap organized around the textbook
General Chemistry -Atoms First
By OpenStax

I II III IV V VI VII VIII IX X XI XII XIII XIV XV XVI XVII XVIII XIX XX XXI ● **Homework**

This chapter will illustrate the chemistry of acid-base reactions and equilibria, and provide you with tools for quantifying the concentrations of acids and bases in solutions.

Topic hierarchy

13.1: Brønsted-Lowry Acids and Bases
13.2: pH and pOH
13.3: Relative Strengths of Acids and Bases
13.4: Hydrolysis of Salt Solutions
13.5: Polyprotic Acids
13.6: Buffers
13.7: Acid-Base Titrations
13.8: Acid-Base Equilibria (Exercises)

Contributors

- Paul Flowers (University of North Carolina - Pembroke), Klaus Theopold (University of Delaware) and Richard Langley (Stephen F. Austin State University) with contributing authors. Textbook content produced by OpenStax College is licensed under a Creative Commons Attribution License 4.0 license. Download for free at http://cnx.org/contents/85abf193-2bd...a7ac8df6@9.110).

This page titled 13: Acid-Base Equilibria is shared under a CC BY license and was authored, remixed, and/or curated by OpenStax.

13.1: Brønsted-Lowry Acids and Bases

Learning Objectives

- Identify acids, bases, and conjugate acid-base pairs according to the Brønsted-Lowry definition
- Write equations for acid and base ionization reactions
- Use the ion-product constant for water to calculate hydronium and hydroxide ion concentrations
- Describe the acid-base behavior of amphiprotic substances

Acids and bases have been known for a long time. When Robert Boyle characterized them in 1680, he noted that acids dissolve many substances, change the color of certain natural dyes (for example, they change litmus from blue to red), and lose these characteristic properties after coming into contact with alkalis (bases). In the eighteenth century, it was recognized that acids have a sour taste, react with limestone to liberate a gaseous substance (now known to be CO_2), and interact with alkalis to form neutral substances. In 1815, Humphry Davy contributed greatly to the development of the modern acid-base concept by demonstrating that hydrogen is the essential constituent of acids. Around that same time, Joseph Louis Gay-Lussac concluded that acids are substances that can neutralize bases and that these two classes of substances can be defined only in terms of each other. The significance of hydrogen was reemphasized in 1884 when Svante Arrhenius defined an acid as a compound that dissolves in water to yield hydrogen cations (now recognized to be hydronium ions) and a base as a compound that dissolves in water to yield hydroxide anions.

In an earlier chapter on chemical reactions, we defined acids and bases as Arrhenius did: We identified an acid as a compound that dissolves in water to yield hydronium ions (H_3O^+) and a base as a compound that dissolves in water to yield hydroxide ions (OH^-). This definition is not wrong; it is simply limited.

Later, we extended the definition of an acid or a base using the more general definition proposed in 1923 by the Danish chemist Johannes Brønsted and the English chemist Thomas Lowry. Their definition centers on the proton, H^+. A proton is what remains when a normal hydrogen atom, ^1_1H, loses an electron. A compound that donates a proton to another compound is called a Brønsted-Lowry acid, and a compound that accepts a proton is called a Brønsted-Lowry base. An acid-base reaction is the transfer of a proton from a proton donor (acid) to a proton acceptor (base). In a subsequent chapter of this text we will introduce the most general model of acid-base behavior introduced by the American chemist G. N. Lewis.

Acids may be compounds such as HCl or H_2SO_4, organic acids like acetic acid (CH_3COOH) or ascorbic acid (vitamin C), or H_2O. Anions (such as HSO_4^-, $H_2PO_4^-$, HS^-, and HCO_3^-) and cations (such as H_3O^+, NH_4^+, and $[Al(H_2O)_6]^{3+}$) may also act as acids. Bases fall into the same three categories. Bases may be neutral molecules (such as H_2O, NH_3, and CH_3NH_2), anions (such as OH^-, HS^-, HCO_3^-, CO_3^{2-}, F^-, and PO_4^{3-}), or cations (such as $[Al(H_2O)_5OH]^{2+}$). The most familiar bases are ionic compounds such as $NaOH$ and $Ca(OH)_2$, which contain the hydroxide ion, OH^-. The hydroxide ion in these compounds accepts a proton from acids to form water:

$$H^+ + OH^- \rightarrow H_2O \tag{13.1.1}$$

We call the product that remains after an acid donates a proton the conjugate base of the acid. This species is a base because it can accept a proton (to re-form the acid):

$$\text{acid} \rightleftharpoons \text{proton} + \text{conjugate base} \tag{13.1.2}$$

$$HF \rightleftharpoons H^+ + F^- \tag{13.1.3}$$

$$H_2SO_4 \rightleftharpoons H^+ + HSO_4^- \tag{13.1.4}$$

$$H_2O \rightleftharpoons H^+ + OH^- \tag{13.1.5}$$

$$HSO_4^- \rightleftharpoons H^+ + SO_4^{2-} \tag{13.1.6}$$

$$NH_4^+ \rightleftharpoons H^+ + NH_3 \tag{13.1.7}$$

We call the product that results when a base accepts a proton the base's conjugate acid. This species is an acid because it can give up a proton (and thus re-form the base):

$$\text{base} + \text{proton} \rightleftharpoons \text{conjugate acid} \tag{13.1.8}$$

$$OH^- + H^+ \rightleftharpoons H_2O \tag{13.1.9}$$

$$H_2O + H^+ \rightleftharpoons H_3O^+ \tag{13.1.10}$$

$$NH_3 + H^+ \rightleftharpoons NH_4^+ \tag{13.1.11}$$

$$S^{2-} + H^+ \rightleftharpoons HS^- \tag{13.1.12}$$

$$CO_3^{2-} + H^+ \rightleftharpoons HCO_3^- \tag{13.1.13}$$

$$F^- + H^+ \rightleftharpoons HF \tag{13.1.14}$$

In these two sets of equations, the behaviors of acids as proton donors and bases as proton acceptors are represented in isolation. In reality, all acid-base reactions involve the transfer of protons between acids and bases. For example, consider the acid-base reaction that takes place when ammonia is dissolved in water. A water molecule (functioning as an acid) transfers a proton to an ammonia molecule (functioning as a base), yielding the conjugate base of water, OH^-, and the conjugate acid of ammonia, NH_4^+:

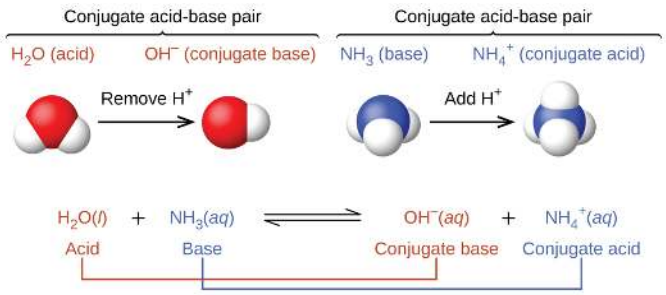

This figure has three parts in two rows. In the first row, two diagrams of acid-base pairs are shown. On the left, a space filling model of H subscript 2 O is shown with a red O atom at the center and two smaller white H atoms attached in a bent shape. Above this model is the label “H subscript 2 O (acid)” in purple. An arrow points right, which is labeled “Remove H superscript plus.” To the right is another space filling model with a single red O atom to which a single smaller white H atom is attached. The label in purple above this model reads, “O H superscript negative (conjugate base).” Above both of these red and white models is an upward pointing bracket that is labeled “Conjugate acid-base pair.” To the right is a space filling model with a central blue N atom to which three smaller white H atoms are attached in a triangular pyramid arrangement. A label in green above reads “N H subscript 3 (base).” An arrow labeled “Add H superscript plus” points right. To the right of the arrow is another space filling model with a blue central N atom and four smaller white H atoms in a tetrahedral arrangement. The green label above reads “N H subscript 3 superscript plus (conjugate acid).” Above both of these blue and white models is an upward pointing bracket that is labeled “Conjugate acid-base pair.” The second row of the figure shows the chemical reaction, H subscript 2 O (l) is shown in purple, and is labeled below in purple as “acid,” plus N H subscript 3 (a q) in green, labeled below in green as “base,” followed by a double sided arrow arrow and O H superscript negative (a q) in purple, labeled in purple as “conjugate base,” plus N H subscript 4 superscript plus (a q)” in green, which is labeled in green as “conjugate acid.” The acid on the left side of the equation is connected to the conjugate base on the right with a purple line. Similarly, the base on the left is connected to the conjugate acid on the right side.

The reaction between a Brønsted-Lowry acid and water is called acid ionization. For example, when hydrogen fluoride dissolves in water and ionizes, protons are transferred from hydrogen fluoride molecules to water molecules, yielding hydronium ions and fluoride ions:

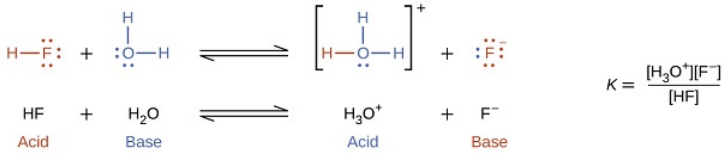

This figure has two rows. In both rows, a chemical reaction is shown. In the first, structural formulas are provided. In this model, in purple, an H atom is connected to an F atom with a single bond. The F atom has pairs of electron dots at the top, right, and bottom. This is followed by a plus sign, which is followed in green by an O atom which has H atoms singly bonded above and to the right. The O atom has pairs of electron dots on its left and lower sides. A double arrow follows. To the right, in brackets is a structure with a central O atom in green, with green H atoms singly bonded above and to the right. A pair of green electron dots is on the lower side of the O atom. To the left of the green O atom, a purple H atom is singly bonded. This is followed by a plus sign and an F atom in purple with pairs of electron dots above, right, below, and to the left. This atom also has a superscript negative sign. The reaction is written in symbolic form below. H F is labeled in purple below as “Acid subscript 1.” This is followed by plus H subscript 2 O, which is labeled in green below as “Base subscript 2.” A double sided arrow follows. To the right is H subscript 3 O superscript plus, which is labeled in green as below in as “Acid subscript 2.” This is followed by plus and F surrounded by 4 pairs of dots and superscript negative. The label below in purple reads, “Base subscript 1.” To the right of the reactions is the formula, K subscript a equals left bracket H subscript 3 O superscript plus right bracket left bracket F superscript negative right bracket all over left bracket H F right bracket.

When we add a base to water, a base ionization reaction occurs in which protons are transferred from water molecules to base molecules. For example, adding pyridine to water yields hydroxide ions and pyridinium ions:

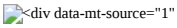

Notice that both these ionization reactions are represented as equilibrium processes. The relative extent to which these acid and base ionization reactions proceed is an important topic treated in a later section of this chapter. In the preceding paragraphs we saw that water can function as either an acid or a base, depending on the nature of the solute dissolved in it. In fact, in pure water or in any aqueous solution, water acts both as an acid and a base. A very small fraction of water molecules donate protons to other water molecules to form hydronium ions and hydroxide ions:

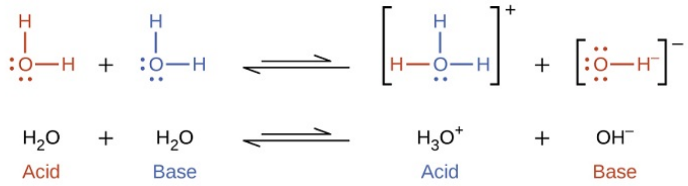

This figure has two rows. In both rows, a chemical reaction is shown. In the first, structural formulas are provided. In this model, in purple, O atom which has H atoms singly bonded above and to the right. The O atom has pairs of electron dots on its left and lower sides. This is followed by a plus sign, which is followed in green by an O atom which has H atoms singly bonded above and to the right. The O atom has pairs of electron dots on its left and lower sides. A double arrow follows. To the right, in brackets is a structure with a central O atom in green, with green H atoms singly bonded above and to the right. A pair of green electron dots is on the lower side of the O atom. To the left of the green O atom, a purple H atom is singly bonded. Outside the brackets to the right is a superscript plus. This is followed by a plus sign and an O atom in purple with pairs of electron dots above, left, and below. An H atom is singly bonded to the right. This atom has a superscript negative sign. The reaction is written in symbolic form below. H subscript 2 O is labeled in purple below as “Acid subscript 1.” This is followed by plus H subscript 2 O, which is labeled in green below as “Base subscript 2.” A double sided arrow follows. To the right is H subscript 3 O superscript plus, which is labeled in green as below in as “Acid subscript 2.” This is followed by plus and O with pairs of dots above, below, and to the left with a singly bonded H on the right with a superscript negative. The label below in purple reads, “ Base subscript 1.”

This type of reaction, in which a substance ionizes when one molecule of the substance reacts with another molecule of the same substance, is referred to as **autoionization**. Pure water undergoes autoionization to a very slight extent. Only about two out of every 10^9 molecules in a sample of pure water are ionized at 25 °C. The equilibrium constant for the ionization of water is called the ion-product constant for water (K_w):

$$H_2O_{(l)} + H_2O_{(l)} \rightleftharpoons H_3O^+_{(aq)} + OH^-_{(aq)} \quad K_w = [H_3O^+][OH^-] \tag{13.1.15}$$

The slight ionization of pure water is reflected in the small value of the equilibrium constant; at 25 °C, Kw has a value of 1.0×10^{-14}. The process is endothermic, and so the extent of ionization and the resulting concentrations of hydronium ion and

hydroxide ion increase with temperature. For example, at 100 °C, the value for K_w is approximately 5.1×10^{-13}, roughly 50-times larger than the value at 25 °C.

Example 13.1.1: Ion Concentrations in Pure Water

What are the hydronium ion concentration and the hydroxide ion concentration in pure water at 25 °C?

Solution

The autoionization of water yields the same number of hydronium and hydroxide ions. Therefore, in pure water, $[H_3O^+] = [OH^-]$. At 25 °C:

$$K_w = [H_3O^+][OH^-] = [H_3O^+]^2 = [OH^-]^2 = 1.0 \times 10^{-14}$$

So:

$$[H_3O^+] = [OH^-] = \sqrt{1.0 \times 10^{-14}} = 1.0 \times 10^{-7}\ M$$

The hydronium ion concentration and the hydroxide ion concentration are the same, and we find that both equal $1.0 \times 10^{-7}\ M$.

Exercise 13.1.1

The ion product of water at 80 °C is 2.4×10^{-13}. What are the concentrations of hydronium and hydroxide ions in pure water at 80 °C?

Answer

$[H_3O^+] = [OH^-] = 4.9 \times 10^{-7}\ M$

It is important to realize that the autoionization equilibrium for water is established in all aqueous solutions. Adding an acid or base to water will not change the position of the equilibrium. Example 14.12 demonstrates the quantitative aspects of this relation between hydronium and hydroxide ion concentrations.

Example 13.1.2: The Inverse Proportionality of $[H_3O^+]$ and $[OH^-]$

The Inverse Proportionality of $[H_3O^+]$ and $[OH^-]$ A solution of carbon dioxide in water has a hydronium ion concentration of $2.0 \times 10^{-6}\ M$. What is the concentration of hydroxide ion at 25 °C?

Solution

We know the value of the ion-product constant for water at 25 °C:

$$2\,H_2O_{(l)} \rightleftharpoons H_3O^+{}_{(aq)} + OH^-{}_{(aq)}$$

$$K_w = [H_3O^+][OH^-] = 1.0 \times 10^{-14}$$

Thus, we can calculate the missing equilibrium concentration.

Rearrangement of the K_w expression yields that $[OH^-]$ is directly proportional to the inverse of $[H_3O^+]$:

$$[OH^-] = \frac{K_w}{[H_3O^+]} = \frac{1.0 \times 10^{-14}}{2.0 \times 10^{-6}} = 5.0 \times 10^{-9}$$

The hydroxide ion concentration in water is reduced to $5.0 \times 10^{-9}\ M$ as the hydrogen ion concentration increases to $2.0 \times 10^{-6}\ M$. This is expected from Le Chatelier's principle; the autoionization reaction shifts to the left to reduce the stress of the increased hydronium ion concentration and the $[OH^-]$ is reduced relative to that in pure water.

A check of these concentrations confirms that our arithmetic is correct:

$$K_w = [H_3O^+][OH^-]$$
$$= (2.0 \times 10^{-6})(5.0 \times 10^{-9})$$
$$= 1.0 \times 10^{-14}$$

? Exercise 13.1.2

What is the hydronium ion concentration in an aqueous solution with a hydroxide ion concentration of 0.001 M at 25 °C?

Answer

$$[H_3O^+] = 1 \times 10^{-11} M$$

Amphiprotic Species

Like water, many molecules and ions may either gain or lose a proton under the appropriate conditions. Such species are said to be amphiprotic. Another term used to describe such species is amphoteric, which is a more general term for a species that may act either as an acid or a base by any definition (not just the Brønsted-Lowry one). Consider for example the bicarbonate ion, which may either donate or accept a proton as shown here:

$$HCO^-_{3(aq)} + H_2O_{(l)} \rightleftharpoons CO^{2-}_{3(aq)} + H_3O^+_{(aq)} \quad (13.1.16)$$

$$HCO^-_{3(aq)} + H_2O_{(l)} \rightleftharpoons H_2CO_{3(aq)} + OH^-_{(aq)} \quad (13.1.17)$$

✓ Example 13.1.3: The Acid-Base Behavior of an Amphoteric Substance

Write separate equations representing the reaction of HSO_3^-

a. as an acid with OH^-
b. as a base with HI

Solution

a. $HSO_3^-(aq) + OH^-(aq) \rightleftharpoons SO_3^{2-}(aq) + H_2O_{(l)}$
b. $HSO_3^-(aq) + HI(aq) \rightleftharpoons H_2SO_3(aq) + I^-(aq)$

? Exercise 13.1.3

Write separate equations representing the reaction of $H_2PO_4^-$

a. as a base with HBr
b. as an acid with OH^-

Answer a

$$H_2PO_4^-(aq) + HBr(aq) \rightleftharpoons H_3PO_4(aq) + Br^-(aq)$$

Answer b

$$H_2PO_4^-(aq) + OH^-(aq) \rightleftharpoons HPO_4^{2-}(aq) + H_2O_{(l)}$$

Summary

A compound that can donate a proton (a hydrogen ion) to another compound is called a Brønsted-Lowry acid. The compound that accepts the proton is called a Brønsted-Lowry base. The species remaining after a Brønsted-Lowry acid has lost a proton is the conjugate base of the acid. The species formed when a Brønsted-Lowry base gains a proton is the conjugate acid of the base. Thus, an acid-base reaction occurs when a proton is transferred from an acid to a base, with formation of the conjugate base of the reactant acid and formation of the conjugate acid of the reactant base. Amphiprotic species can act as both proton donors and

proton acceptors. Water is the most important amphiprotic species. It can form both the hydronium ion, H_3O^+, and the hydroxide ion, OH^- when it undergoes autoionization:

$$2\,H_2O_{(l)} \rightleftharpoons H_3O^+(aq) + OH^-(aq)$$

The ion product of water, K_w is the equilibrium constant for the autoionization reaction:

$$K_w = [H_3O^+][OH^-] = 1.0 \times 10^{-14} \text{ at } 25°C$$

Key Equations

- $$K_w = [H_3O^+][OH^-\,] = 1.0 \times 10^{-14} \text{ (at 25 °C)}$$

Glossary

acid ionization
reaction involving the transfer of a proton from an acid to water, yielding hydronium ions and the conjugate base of the acid

amphiprotic
species that may either gain or lose a proton in a reaction

amphoteric
species that can act as either an acid or a base

autoionization
reaction between identical species yielding ionic products; for water, this reaction involves transfer of protons to yield hydronium and hydroxide ions

base ionization
reaction involving the transfer of a proton from water to a base, yielding hydroxide ions and the conjugate acid of the base

Brønsted-Lowry acid
proton donor

Brønsted-Lowry base
proton acceptor

conjugate acid
substance formed when a base gains a proton

conjugate base
substance formed when an acid loses a proton

ion-product constant for water (K_w)
equilibrium constant for the autoionization of water

This page titled 13.1: Brønsted-Lowry Acids and Bases is shared under a CC BY license and was authored, remixed, and/or curated by OpenStax.

- **14.1: Brønsted-Lowry Acids and Bases** by OpenStax is licensed CC BY 4.0. Original source: https://openstax.org/details/books/chemistry-2e.

13.2: pH and pOH

Learning Objectives

- Explain the characterization of aqueous solutions as acidic, basic, or neutral
- Express hydronium and hydroxide ion concentrations on the pH and pOH scales
- Perform calculations relating pH and pOH

As discussed earlier, hydronium and hydroxide ions are present both in pure water and in all aqueous solutions, and their concentrations are inversely proportional as determined by the ion product of water (K_w). The concentrations of these ions in a solution are often critical determinants of the solution's properties and the chemical behaviors of its other solutes, and specific vocabulary has been developed to describe these concentrations in relative terms. A solution is neutral if it contains equal concentrations of hydronium and hydroxide ions; acidic if it contains a greater concentration of hydronium ions than hydroxide ions; and basic if it contains a lesser concentration of hydronium ions than hydroxide ions.

A common means of expressing quantities, the values of which may span many orders of magnitude, is to use a logarithmic scale. One such scale that is very popular for chemical concentrations and equilibrium constants is based on the p-function, defined as shown where "X" is the quantity of interest and "log" is the base-10 logarithm:

$$\mathrm{pX} = -\log \mathrm{X} \tag{13.2.1}$$

The pH of a solution is therefore defined as shown here, where $[H_3O^+]$ is the molar concentration of hydronium ion in the solution:

$$\mathrm{pH} = -\log[\mathrm{H_3O^+}] \tag{13.2.2}$$

Rearranging this equation to isolate the hydronium ion molarity yields the equivalent expression:

$$[\mathrm{H_3O^+}] = 10^{-\mathrm{pH}} \tag{13.2.3}$$

Likewise, the hydroxide ion molarity may be expressed as a p-function, or pOH:

$$\mathrm{pOH} = -\log[\mathrm{OH^-}] \tag{13.2.4}$$

or

$$[\mathrm{OH^-}] = 10^{-\mathrm{pOH}} \tag{13.2.5}$$

Finally, the relation between these two ion concentration expressed as p-functions is easily derived from the K_w expression:

$$K_\mathrm{w} = [\mathrm{H_3O^+}][\mathrm{OH^-}] \tag{13.2.6}$$

$$-\log K_\mathrm{w} = -\log([\mathrm{H_3O^+}][\mathrm{OH^-}]) = -\log[\mathrm{H_3O^+}] + -\log[\mathrm{OH^-}] \tag{13.2.7}$$

$$\mathrm{p}K_\mathrm{w} = \mathrm{pH} + \mathrm{pOH} \tag{13.2.8}$$

At 25 °C, the value of K_w is 1.0×10^{-14}, and so:

$$14.00 = \mathrm{pH} + \mathrm{pOH} \tag{13.2.9}$$

The hydronium ion molarity in pure water (or any neutral solution) is $1.0 \times 10^{-7}\ M$ at 25 °C. The pH and pOH of a neutral solution at this temperature are therefore:

$$\mathrm{pH} = -\log[\mathrm{H_3O^+}] = -\log(1.0 \times 10^{-7}) = 7.00 \tag{13.2.10}$$

$$\mathrm{pOH} = -\log[\mathrm{OH^-}] = -\log(1.0 \times 10^{-7}) = 7.00 \tag{13.2.11}$$

And so, at this temperature, acidic solutions are those with hydronium ion molarities greater than $1.0 \times 10^{-7}\ M$ and hydroxide ion molarities less than $1.0 \times 10^{-7}\ M$ (corresponding to pH values less than 7.00 and pOH values greater than 7.00). Basic solutions are those with hydronium ion molarities less than $1.0 \times 10^{-7}\ M$ and hydroxide ion molarities greater than $1.0 \times 10^{-7}\ M$ (corresponding to pH values greater than 7.00 and pOH values less than 7.00).

When $pH = 7$ Solutions are not Neutral

Since the autoionization constant K_w is temperature dependent, these correlations between pH values and the acidic/neutral/basic adjectives will be different at temperatures other than 25 °C. For example, the hydronium molarity of pure water at 80 °C is 4.9×10^{-7} *M*, which corresponds to pH and pOH values of:

$$\begin{aligned} pH &= -\log[H_3O^+] \\ &= -\log(4.9 \times 10^{-7}) \\ &= 6.31 \end{aligned}$$

$$\begin{aligned} pOH &= -\log[OH^-] \\ &= -\log(4.9 \times 10^{-7}) \\ &= 6.31 \end{aligned}$$

At this temperature, then, neutral solutions exhibit pH = pOH = 6.31, acidic solutions exhibit pH less than 6.31 and pOH greater than 6.31, whereas basic solutions exhibit pH greater than 6.31 and pOH less than 6.31. This distinction can be important when studying certain processes that occur at nonstandard temperatures, such as enzyme reactions in warm-blooded organisms. Unless otherwise noted, references to pH values are presumed to be those at standard temperature (25 °C) (Table **13.2.1**).

Table **13.2.1**: Summary of Relations for Acidic, Basic and Neutral Solutions

Classification	Relative Ion Concentrations	pH at 25 °C
acidic	$[H_3O^+] > [OH^-]$	pH < 7
neutral	$[H_3O^+] = [OH^-]$	pH = 7
basic	$[H_3O^+] < [OH^-]$	pH > 7

Figure **13.2.1** shows the relationships between $[H_3O^+]$, $[OH^-]$, pH, and pOH, and gives values for these properties at standard temperatures for some common substances.

$[H_3O^+]$ (M)	$[OH^-]$ (M)	pH	pOH	Sample Solution
10^{1}	10^{-15}	–1	15	
10^{0} or 1	10^{-14}	0	14	1 M HCl
10^{-1}	10^{-13}	1	13	
10^{-2}	10^{-12}	2	12	gastric juice, lime juice, 1 M CH_3CO_2H (vinegar)
10^{-3}	10^{-11}	3	11	stomach acid
10^{-4}	10^{-10}	4	10	wine, orange juice
10^{-5}	10^{-9}	5	9	coffee
10^{-6}	10^{-8}	6	8	rain water
10^{-7}	10^{-7}	7	7	pure water
10^{-8}	10^{-6}	8	6	blood, ocean water, baking soda
10^{-9}	10^{-5}	9	5	
10^{-10}	10^{-4}	10	4	Milk of Magnesia
10^{-11}	10^{-3}	11	3	
10^{-12}	10^{-2}	12	2	household ammonia, NH_3
10^{-13}	10^{-1}	13	1	bleach
10^{-14}	10^{0} or 1	14	0	1 M NaOH
10^{-15}	10^{1}	15	–1	

Figure **13.2.1**: The pH and pOH scales represent concentrations of $[H_3O^+]$ and OH^-, respectively. The pH and pOH values of some common substances at standard temperature (25 °C) are shown in this chart.

A table is provided with 5 columns. The first column is labeled “left bracket H subscript 3 O superscript plus right bracket (M).” Powers of ten are listed in the column beginning at 10 superscript 1, including 10 superscript 0 or 1, 10 superscript negative 1, decreasing by single powers of 10 to 10 superscript negative 15. The second column is labeled “left bracket O H superscript negative right bracket (M).” Powers of ten are listed in the column beginning at 10 superscript negative 15, increasing by single powers of 10 to including 10 superscript 0 or 1, and 10 superscript 1. The third column is labeled “p H.” Values listed in this column are integers beginning at negative 1, increasing by ones up to 14. The fourth column is labeled “p O H.” Values in this column are integers beginning at 15, decreasing by ones up to negative 1. The fifth column is labeled “Sample Solution.” A vertical line at the left of the column has tick marks corresponding to each p H level in the table. Substances are listed next to this line segment with line segments connecting them to the line to show approximate p H and p O H values. 1 M H C l is listed at a p H of 0. Gastric juices are listed at a p H of about 1.5. Lime juice is listed at a p H of about 2, followed by 1 M C H subscript 3 C O subscript 2 H, followed by stomach acid at a p H value of nearly 3. Wine is listed around 3.5. Coffee is listed just past 5. Pure water is listed at a p H of 7. Pure blood is just beyond 7. Milk of Magnesia is listed just past a p H of 10.5. Household ammonia is listed just before a pH of 12. 1 M N a O H is listed at a p H of 0. To the right of this labeled arrow is an arrow that points up and down through the height of the column. A beige strip passes through the table and to this double headed arrow at p H 7. To the left of the double headed arrow in this beige strip is the label “neutral.” A narrow beige strip runs through the arrow. Just above and below this region, the arrow is purple. It gradually turns to a bright red as it extends upward. At the top of the arrow, near the head of the arrow is the label “acidic.” Similarly, the lower region changes color from purple to blue moving to the bottom of the column. The head at this end of the arrow is labeled “basic.”

Example 13.2.1: Calculation of pH from $[H_3O^+]$

What is the pH of stomach acid, a solution of HCl with a hydronium ion concentration of $1.2 \times 10^{-3}\ M$?

Solution

$$\begin{aligned} pH &= -\log[H_3O^+] \\ &= -\log(1.2 \times 10^{-3}) \\ &= -(-2.92) \\ &= 2.92 \end{aligned}$$

Exercise 13.2.1

Water exposed to air contains carbonic acid, H_2CO_3, due to the reaction between carbon dioxide and water:

$$\mathrm{CO_2\,(aq) + H_2O\,(l) \rightleftharpoons H_2CO_3\,(aq)}$$

Air-saturated water has a hydronium ion concentration caused by the dissolved $\mathrm{CO_2}$ of $2.0 \times 10^{-6}\ M$, about 20-times larger than that of pure water. Calculate the pH of the solution at 25 °C.

Answer

5.70

Example 13.2.2: Calculation of Hydronium Ion Concentration from pH

Calculate the hydronium ion concentration of blood, the pH of which is 7.3 (slightly alkaline).

Solution

$$\mathrm{pH = -\log[H_3O^+] = 7.3}$$

$$\mathrm{\log[H_3O^+] = -7.3}$$

$$\mathrm{[H_3O^+] = 10^{-7.3}}$$

or

$$\mathrm{[H_3O^+] = antilog\ of - 7.3}$$

$$[\mathrm{H_3O^+}] = 5 \times 10^{-8}\ M$$

(On a calculator take the antilog, or the "inverse" log, of −7.3, or calculate $10^{-7.3}$.)

Exercise 13.2.2

Calculate the hydronium ion concentration of a solution with a pH of −1.07.

Answer

12 M

Environmental Science

Normal rainwater has a pH between 5 and 6 due to the presence of dissolved CO_2 which forms carbonic acid:

$$\mathrm{H_2O\,(l) + CO_2\,(g) \longrightarrow H_2CO_3\,(aq)} \tag{13.2.12}$$

$$\mathrm{H_2CO_3\,(aq) \rightleftharpoons H^+\,(aq) + HCO_3^-\,(aq)} \tag{13.2.13}$$

Acid rain is rainwater that has a pH of less than 5, due to a variety of nonmetal oxides, including CO_2, SO_2, SO_3, NO, and NO_2 being dissolved in the water and reacting with it to form not only carbonic acid, but sulfuric acid and nitric acid. The formation and subsequent ionization of sulfuric acid are shown here:

$$\mathrm{H_2O\,(l) + SO_3\,(g) \longrightarrow H_2SO_4\,(aq)} \tag{13.2.14}$$

$$\mathrm{H_2SO_4\,(aq) \longrightarrow H^+\,(aq) + HSO_4^-\,(aq)} \tag{13.2.15}$$

Carbon dioxide is naturally present in the atmosphere because we and most other organisms produce it as a waste product of metabolism. Carbon dioxide is also formed when fires release carbon stored in vegetation or when we burn wood or fossil fuels. Sulfur trioxide in the atmosphere is naturally produced by volcanic activity, but it also stems from burning fossil fuels, which have traces of sulfur, and from the process of "roasting" ores of metal sulfides in metal-refining processes. Oxides of nitrogen are

formed in internal combustion engines where the high temperatures make it possible for the nitrogen and oxygen in air to chemically combine.

Acid rain is a particular problem in industrial areas where the products of combustion and smelting are released into the air without being stripped of sulfur and nitrogen oxides. In North America and Europe until the 1980s, it was responsible for the destruction of forests and freshwater lakes, when the acidity of the rain actually killed trees, damaged soil, and made lakes uninhabitable for all but the most acid-tolerant species. Acid rain also corrodes statuary and building facades that are made of marble and limestone (Figure **13.2.2**). Regulations limiting the amount of sulfur and nitrogen oxides that can be released into the atmosphere by industry and automobiles have reduced the severity of acid damage to both natural and manmade environments in North America and Europe. It is now a growing problem in industrial areas of China and India.

Figure **13.2.2**: (a) Acid rain makes trees more susceptible to drought and insect infestation, and depletes nutrients in the soil. (b) It also is corrodes statues that are carved from marble or limestone. (credit a: modification of work by Chris M Morris; credit b: modification of work by "Eden, Janine and Jim"/Flickr)

Two photos are shown. Photograph a on the left shows the upper portion of trees against a bright blue sky. The tops of several trees at the center of the photograph have bare branches and appear to be dead. Image b shows a statue of a man that appears to from the revolutionary war era in either marble or limestone.

✔ Example **13.2.3**: Calculation of pOH

What are the pOH and the pH of a 0.0125-M solution of potassium hydroxide, KOH?

Solution

Potassium hydroxide is a highly soluble ionic compound and completely dissociates when dissolved in dilute solution, yielding $[OH^-] = 0.0125$ M:

$$\mathbf{pOH} = -\log[\mathbf{OH}^-] = -\log 0.0125$$

$$= -(-1.903) = 1.903$$

The pH can be found from the $\mathbf{pOH}$:

$$\mathbf{pH} + \mathbf{pOH} = 14.00$$

$$\mathbf{pH} = 14.00 - \mathbf{pOH} = 14.00 - 1.903 = 12.10$$

? Exercise **13.2.3**

The hydronium ion concentration of vinegar is approximately $4 \times 10^{-3}\ M$. What are the corresponding values of pOH and pH?

Answer

pOH = 11.6,

pH = 14.00 - pOH = 2.4

The acidity of a solution is typically assessed experimentally by measurement of its pH. The pOH of a solution is not usually measured, as it is easily calculated from an experimentally determined pH value. The pH of a solution can be directly measured using a pH meter (Figure **13.2.3**).



(a) (b)

Figure **13.2.3**: (a) A research-grade pH meter used in a laboratory can have a resolution of 0.001 pH units, an accuracy of ± 0.002 pH units, and may cost in excess of $1000. (b) A portable pH meter has lower resolution (0.01 pH units), lower accuracy (± 0.2 pH units), and a far lower price tag. (credit b: modification of work by Jacopo Werther)

This figure contains two images. The first, image a, is of an analytical digital p H meter on a laboratory counter. The second, image b, is of a portable hand held digital p H meter.

The pH of a solution may also be visually estimated using colored indicators (Figure **13.2.3**).

(a) (b)

Figure **13.2.4**: (a) A universal indicator assumes a different color in solutions of different pH values. Thus, it can be added to a solution to determine the pH of the solution. The eight vials each contain a universal indicator and 0.1-M solutions of progressively weaker acids: HCl (pH = l), CH_3CO_2H (pH = 3), and NH_4Cl (pH = 5), deionized water, a neutral substance (pH = 7); and 0.1-M solutions of the progressively stronger bases: KCl (pH = 7), aniline, $C_6H_5NH_2$ (pH = 9), NH_3 (pH = 11), and NaOH (pH = 13). (b) pH paper contains a mixture of indicators that give different colors in solutions of differing pH values. (credit: modification of work by Sahar Atwa).

This figure contains two images. The first shows a variety of colors of solutions in labeled beakers. A red solution in a beaker is labeled “0.10 M H C l.” An orange solution is labeled “0.10 M C H subscript 3 C O O H.” A yellow-orange solution is labeled “0.1 M N H subscript 4 C l.” A yellow solution is labeled “deionized water.” A second solution beaker is labeled “0.10 M K C l.” A green solution is labeled “0.10 M aniline.” A blue solution is labeled “0.10 M N H subscript 4 C l (a q).” A final beaker containing a dark blue solution is labeled “0.10 M N a O H.” Image b shows pHydrion paper that is used for measuring pH in the range of p H from 1 to 12. The color scale for identifying p H based on color is shown along with several of the test strips used to evaluate p H.

Summary

The concentration of hydronium ion in a solution of an acid in water is greater than $1.0 \times 10^{-7}\ M$ at 25 °C. The concentration of hydroxide ion in a solution of a base in water is greater than $1.0 \times 10^{-7}\ M$ at 25 °C. The concentration of H_3O^+ in a solution can be expressed as the pH of the solution; $\mathbf{pH = -\log H_3O^+}$. The concentration of OH^- can be expressed as the pOH of the solution: $\mathbf{pOH = -\log[OH^-]}$. In pure water, pH = 7.00 and pOH = 7.00

Key Equations

- $\mathbf{pH = -\log[H_3O^+]}$
- $\mathbf{pOH = -\log[OH^-]}$
- $[H_3O^+] = 10^{-\text{pH}}$
- $[OH^-] = 10^{-\text{pOH}}$
- pH + pOH = pK_w = 14.00 at 25 °C

Glossary

acidic

describes a solution in which $[H_3O^+] > [OH^-]$

basic

describes a solution in which $[H_3O^+] < [OH^-]$

neutral

describes a solution in which $[H_3O^+] = [OH^-]$

pH

logarithmic measure of the concentration of hydronium ions in a solution

pOH

logarithmic measure of the concentration of hydroxide ions in a solution

---

This page titled 13.2: pH and pOH is shared under a CC BY license and was authored, remixed, and/or curated by OpenStax.

- **14.2: pH and pOH** by OpenStax is licensed CC BY 4.0. Original source: https://openstax.org/details/books/chemistry-2e.

13.3: Relative Strengths of Acids and Bases

Learning Objectives

- Assess the relative strengths of acids and bases according to their ionization constants
- Rationalize trends in acid–base strength in relation to molecular structure
- Carry out equilibrium calculations for weak acid–base systems

We can rank the strengths of acids by the extent to which they ionize in aqueous solution. The reaction of an acid with water is given by the general expression:

$$\mathrm{HA}(aq) + \mathrm{H_2O}(l) \rightleftharpoons \mathrm{H_3O^+}(aq) + \mathrm{A^-}(aq) \tag{13.3.1}$$

Water is the base that reacts with the acid **HA**, $\mathrm{A^-}$ is the conjugate base of the acid **HA**, and the hydronium ion is the conjugate acid of water. A strong acid yields 100% (or very nearly so) of $\mathrm{H_3O^+}$ and $\mathrm{A^-}$ when the acid ionizes in water; Figure **13.3.1** lists several strong acids. A weak acid gives small amounts of $\mathrm{H_3O^+}$ and $\mathrm{A^-}$.

***Figure* 13.3.1**: *Some of the common strong acids and bases are listed here.*

Six Strong Acids		Six Strong Bases	
$\mathrm{HClO_4}$	perchloric acid	LiOH	lithium hydroxide
HCl	hydrochloric acid	NaOH	sodium hydroxide
HBr	hydrobromic acid	KOH	potassium hydroxide
HI	hydroiodic acid	$\mathrm{Ca(OH)_2}$	calcium hydroxide
$\mathrm{HNO_3}$	nitric acid	$\mathrm{Sr(OH)_2}$	strontium hydroxide
$\mathrm{H_2SO_4}$	sulfuric acid	$\mathrm{Ba(OH)_2}$	barium hydroxide

The relative strengths of acids may be determined by measuring their equilibrium constants in aqueous solutions. In solutions of the same concentration, stronger acids ionize to a greater extent, and so yield higher concentrations of hydronium ions than do weaker acids. The equilibrium constant for an acid is called the acid-ionization constant, K_a. For the reaction of an acid **HA**:

$$\mathrm{HA}(aq) + \mathrm{H_2O}(l) \rightleftharpoons \mathrm{H_3O^+}(aq) + \mathrm{A^-}(aq) \tag{13.3.2}$$

we write the equation for the ionization constant as:

$$K_a = \frac{[H3O+][A-]}{[HA]} \tag{13.3.3}$$

where the concentrations are those at equilibrium. Although water is a reactant in the reaction, it is the solvent as well, so we do not include $[\mathrm{H_2O}]$ in the equation. The larger the K_a of an acid, the larger the concentration of $\mathrm{H_3O^+}$ and $\mathrm{A^-}$ relative to the concentration of the nonionized acid, **HA**. Thus a stronger acid has a larger ionization constant than does a weaker acid. The ionization constants increase as the strengths of the acids increase.

The following data on acid-ionization constants indicate the order of acid strength: $\mathrm{CH_3CO_2H} < \mathrm{HNO_2} < \mathrm{HSO_4^-}$

$$\begin{aligned} \mathrm{CH_3CO_2H}(aq) + \mathrm{H_2O}(l) &\rightleftharpoons \mathrm{H_3O^+}(aq) + \mathrm{CH_3CO_2^-}(aq) \qquad K_a = 1.8 \times 10^{-5} \\ \mathrm{HNO_2}(aq) + \mathrm{H_2O}(l) &\rightleftharpoons \mathrm{H_3O^+}(aq) + \mathrm{NO_2^-}(aq) \qquad K_a = 4.6 \times 10^{-4} \\ \mathrm{HSO_4^-}(aq) + \mathrm{H_2O}(aq) &\rightleftharpoons \mathrm{H_3O^+}(aq) + \mathrm{SO_4^{2-}}(aq) \qquad K_a = 1.2 \times 10^{-2} \end{aligned} \tag{13.3.4}$$

We can rank the strengths of bases by their tendency to form hydroxide ions in aqueous solution. The reaction of a Brønsted-Lowry base with water is given by:

$$\mathrm{B}(aq) + \mathrm{H_2O}(l) \rightleftharpoons \mathrm{HB^+}(aq) + \mathrm{OH^-}(aq) \tag{13.3.5}$$

Water is the acid that reacts with the base, HB^+ is the conjugate acid of the base **B**, and the hydroxide ion is the conjugate base of water. A strong base yields 100% (or very nearly so) of OH^- and HB^+ when it reacts with water; Figure **13.3.1** lists several strong bases. A weak base yields a small proportion of hydroxide ions. Soluble ionic hydroxides such as NaOH are considered strong bases because they dissociate completely when dissolved in water.

As we did with acids, we can measure the relative strengths of bases by measuring their base-ionization constant (K_b) in aqueous solutions. In solutions of the same concentration, stronger bases ionize to a greater extent, and so yield higher hydroxide ion concentrations than do weaker bases. A stronger base has a larger ionization constant than does a weaker base. For the reaction of a base, **B**:

$$\mathrm{B}(aq) + \mathrm{H_2O}(l) \rightleftharpoons \mathrm{HB^+}(aq) + \mathrm{OH^-}(aq), \tag{13.3.6}$$

we write the equation for the ionization constant as:

$$K_b = \frac{[HB+][OH-]}{[B]} \tag{13.3.7}$$

where the concentrations are those at equilibrium. Again, we do not include $[H_2O]$ in the equation because water is the solvent. The chemical reactions and ionization constants of the three bases shown are:

$$\begin{aligned} \mathrm{NO_2^-}(aq) + \mathrm{H_2O}(l) &\rightleftharpoons \mathrm{HNO_2}(aq) + \mathrm{OH^-}(aq) \qquad K_b = 2.17 \times 10^{-11} \\ \mathrm{CH_3CO_2^-}(aq) + \mathrm{H_2O}(l) &\rightleftharpoons \mathrm{CH_3CO_2H}(aq) + \mathrm{OH^-}(aq) \qquad K_b = 5.6 \times 10^{-10} \\ \mathrm{NH_3}(aq) + \mathrm{H_2O}(l) &\rightleftharpoons \mathrm{NH_4^+}(aq) + \mathrm{OH^-}(aq) \qquad K_b = 1.8 \times 10^{-5} \end{aligned} \tag{13.3.8}$$

A table of ionization constants of weak bases appears in Table E2. As with acids, percent ionization can be measured for basic solutions, but will vary depending on the base ionization constant and the initial concentration of the solution.

Consider the ionization reactions for a conjugate acid-base pair, HA − A^-:

$$\mathrm{HA}(aq) + \mathrm{H_2O}(l) \rightleftharpoons \mathrm{H_3O^+}(aq) + \mathrm{A^-}(aq) \quad K_a = \frac{[H3O+][A-]}{[HA]} \tag{13.3.9}$$

$$\mathrm{A^-}(aq) + \mathrm{H_2O}(l) \rightleftharpoons \mathrm{OH^-}(aq) + \mathrm{HA}(aq) \quad K_b = \frac{[HA][OH]}{[A-]} \tag{13.3.10}$$

Adding these two chemical equations yields the equation for the autoionization for water:

$$\begin{aligned} \cancel{\mathrm{HA}(aq)} + \mathrm{H_2O}(l) + \cancel{\mathrm{A^-}(aq)} + \mathrm{H_2O}(l) &\rightleftharpoons \mathrm{H_3O^+}(aq) \\ + \cancel{\mathrm{A^-}(aq)} + \mathrm{OH^-}(aq) + \cancel{\mathrm{HA}(aq)} & \end{aligned} \tag{13.3.11}$$

$$2\,\mathrm{H_2O}(l) \rightleftharpoons \mathrm{H_3O^+}(aq) + \mathrm{OH^-}(aq) \tag{13.3.12}$$

As shown in the previous chapter on equilibrium, the K expression for a chemical equation derived from adding two or more other equations is the mathematical product of the other equations' K expressions. Multiplying the mass-action expressions together and cancelling common terms, we see that:

$$K_a \times K_b = \frac{[H3O+][A-]}{[HA]} \times \frac{[HA][OH-]}{[A-]} = [\mathrm{H_3O^+}][\mathrm{OH^-}] = K_w \tag{13.3.13}$$

For example, the acid ionization constant of acetic acid (CH_3COOH) is 1.8×10^{-5}, and the base ionization constant of its conjugate base, acetate ion ($\mathrm{CH_3COO^-}$), is 5.6×10^{-10}. The product of these two constants is indeed equal to K_w:

$$K_a \times K_b = (1.8 \times 10^{-5}) \times (5.6 \times 10^{-10}) = 1.0 \times 10^{-14} = K_w \tag{13.3.14}$$

The extent to which an acid, HA, donates protons to water molecules depends on the strength of the conjugate base, A^-, of the acid. If A^- is a strong base, any protons that are donated to water molecules are recaptured by A^-. Thus there is relatively little A^- and $\mathrm{H_3O^+}$ in solution, and the acid, HA, is weak. If A^- is a weak base, water binds the protons more strongly, and the solution contains primarily A^- and H_3O^+—the acid is strong. Strong acids form very weak conjugate bases, and weak acids form stronger conjugate bases (Figure **13.3.2**).

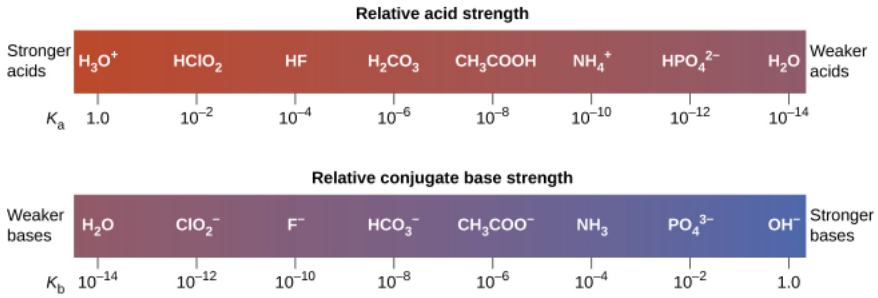

Figure 13.3.2: This diagram shows the relative strengths of conjugate acid-base pairs, as indicated by their ionization constants in aqueous solution.

Figure **13.3.3** lists a series of acids and bases in order of the decreasing strengths of the acids and the corresponding increasing strengths of the bases. The acid and base in a given row are conjugate to each other.

The first six acids in Figure **13.3.3** are the most common strong acids. These acids are completely dissociated in aqueous solution. The conjugate bases of these acids are weaker bases than water. When one of these acids dissolves in water, their protons are completely transferred to water, the stronger base.

Those acids that lie between the hydronium ion and water in Figure **13.3.3** form conjugate bases that can compete with water for possession of a proton. Both hydronium ions and nonionized acid molecules are present in equilibrium in a solution of one of these acids. Compounds that are weaker acids than water (those found below water in the column of acids) in Figure **13.3.3** exhibit no observable acidic behavior when dissolved in water. Their conjugate bases are stronger than the hydroxide ion, and if any conjugate base were formed, it would react with water to re-form the acid.

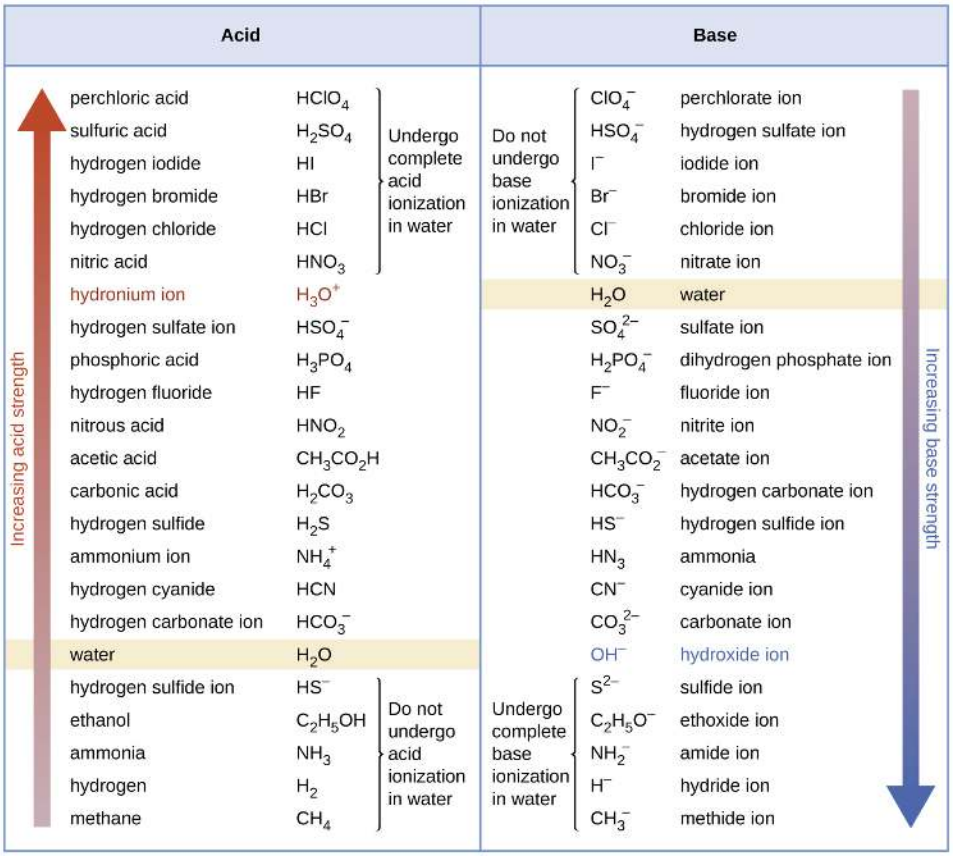

Figure **13.3.3**: The chart shows the relative strengths of conjugate acid-base pairs.

The extent to which a base forms hydroxide ion in aqueous solution depends on the strength of the base relative to that of the hydroxide ion, as shown in the last column in Figure **13.3.3**. A strong base, such as one of those lying below hydroxide ion, accepts protons from water to yield 100% of the conjugate acid and hydroxide ion. Those bases lying between water and hydroxide ion

accept protons from water, but a mixture of the hydroxide ion and the base results. Bases that are weaker than water (those that lie above water in the column of bases) show no observable basic behavior in aqueous solution.

Example 13.3.2: The Product $K_a \times K_b = K_w$

Use the K_b for the nitrite ion, $\mathbf{NO_2^-}$, to calculate the K_a for its conjugate acid.

Solution

K_b for $\mathbf{NO_2^-}$ is given in this section as 2.17×10^{-11}. The conjugate acid of $\mathbf{NO_2^-}$ is HNO_2; K_a for HNO_2 can be calculated using the relationship:

$$K_a \times K_b = 1.0 \times 10^{-14} = K_w \tag{13.3.15}$$

Solving for K_a, we get:

$$K_a = \frac{K_w}{K_b} = \frac{1.0 \times 10^{-14}}{2.17 \times 10^{-11}} = 4.6 \times 10^{-4} \tag{13.3.16}$$

This answer can be verified by finding the K_a for HNO_2 in Table E1

Exercise 13.3.2

We can determine the relative acid strengths of $\mathbf{NH_4^+}$ and HCN by comparing their ionization constants. The ionization constant of HCN is given in Table E1 as 4.9×10^{-10}. The ionization constant of $\mathbf{NH_4^+}$ is not listed, but the ionization constant of its conjugate base, NH_3, is listed as 1.8×10^{-5}. Determine the ionization constant of $\mathbf{NH_4^+}$, and decide which is the stronger acid, HCN or $\mathbf{NH_4^+}$.

Answer

$\mathbf{NH_4^+}$ is the slightly stronger acid (K_a for $\mathbf{NH_4^+}$ = 5.6×10^{-10}).

The Ionization of Weak Acids and Weak Bases

Many acids and bases are weak; that is, they do not ionize fully in aqueous solution. A solution of a weak acid in water is a mixture of the nonionized acid, hydronium ion, and the conjugate base of the acid, with the nonionized acid present in the greatest concentration. Thus, a weak acid increases the hydronium ion concentration in an aqueous solution (but not as much as the same amount of a strong acid).

Acetic acid ($\mathbf{CH_3CO_2H}$) is a weak acid. When we add acetic acid to water, it ionizes to a small extent according to the equation:

$$\mathbf{CH_3CO_2H}(aq) + \mathbf{H_2O}(l) \rightleftharpoons \mathbf{H_3O^+}(aq) + \mathbf{CH_3CO_2^-}(aq) \tag{13.3.17}$$

giving an equilibrium mixture with most of the acid present in the nonionized (molecular) form. This equilibrium, like other equilibria, is dynamic; acetic acid molecules donate hydrogen ions to water molecules and form hydronium ions and acetate ions at the same rate that hydronium ions donate hydrogen ions to acetate ions to reform acetic acid molecules and water molecules. We can tell by measuring the pH of an aqueous solution of known concentration that only a fraction of the weak acid is ionized at any moment (Figure **13.3.4**). The remaining weak acid is present in the nonionized form.

For acetic acid, at equilibrium:

$$K_a = \frac{[H3O+][CH3CO2-]}{[CH3CO2H]} = 1.8 \times 10^{-5} \tag{13.3.18}$$

Figure **13.3.4**: pH paper indicates that a 0.l-M solution of **HCl** (beaker on left) has a pH of 1. The acid is fully ionized and $[H_3O^+]$ = *0.1 M. A 0.1-M solution of* CH_3CO_2H *(beaker on right) has a pH of 3 (* $[H_3O^+]$ = *0.001 M) because the weak acid* CH_3CO_2H *is only partially ionized. In this solution,* $[H_3O^+] < [CH_3CO_2H]$. *(credit: modification of work by Sahar Atwa)*

Table* 13.3.1: Ionization Constants of Some Weak Acids*

Ionization Reaction	K_a at 25 °C
$HSO_4^- + H_2O \rightleftharpoons H_3O^+ + SO_4^{2-}$	1.2×10^{-2}
$HF + H_2O \rightleftharpoons H_3O^+ + F^-$	3.5×10^{-4}
$HNO_2 + H_2O \rightleftharpoons H_3O^+ + NO_2^-$	4.6×10^{-4}
$HNCO + H_2O \rightleftharpoons H_3O^+ + NCO^-$	2×10^{-4}
$HCO_2H + H_2O \rightleftharpoons H_3O^+ + HCO_2^-$	1.8×10^{-4}
$CH_3CO_2H + H_2O \rightleftharpoons H_3O^+ + CH_3CO_2^-$	1.8×10^{-5}
$HClO + H_2O \rightleftharpoons H_3O^+ + ClO^-$	2.9×10^{-8}
$HBrO + H_2O \rightleftharpoons H_3O^+ + BrO^-$	2.8×10^{-9}
$HCN + H_2O \rightleftharpoons H_3O^+ + CN^-$	4.9×10^{-10}

Table **13.3.1** gives the ionization constants for several weak acids; additional ionization constants can be found in Table E1.

At equilibrium, a solution of a weak base in water is a mixture of the nonionized base, the conjugate acid of the weak base, and hydroxide ion with the nonionized base present in the greatest concentration. Thus, a weak base increases the hydroxide ion concentration in an aqueous solution (but not as much as the same amount of a strong base).

For example, a solution of the weak base trimethylamine, $(CH_3)_3N$, in water reacts according to the equation:

$$(CH_3)_3N(aq) + H_2O(l) \rightleftharpoons (CH_3)_3NH^+(aq) + OH^-(aq) \tag{13.3.19}$$

This gives an equilibrium mixture with most of the base present as the nonionized amine. This equilibrium is analogous to that described for weak acids.

We can confirm by measuring the pH of an aqueous solution of a weak base of known concentration that only a fraction of the base reacts with water (Figure 14.4.5). The remaining weak base is present as the unreacted form. The equilibrium constant for the ionization of a weak base, K_b, is called the ionization constant of the weak base, and is equal to the reaction quotient when the reaction is at equilibrium. For trimethylamine, at equilibrium:

$$K_b = \frac{[(CH3)3NH+][OH-]}{[(CH3)3N]} \tag{13.3.20}$$

Figure **13.3.5**: pH paper indicates that a 0.1-M solution of NH_3 (left) is weakly basic. The solution has a pOH of 3 ($[OH^-]$ = 0.001 M) because the weak base NH_3 only partially reacts with water. A 0.1-M solution of NaOH (right) has a pOH of 1 because NaOH is a strong base (credit: modification of work by Sahar Atwa).

The ionization constants of several weak bases are given in Table **13.3.2** and Table E2.

***Table* 13.3.2:** *Ionization Constants of Some Weak Bases*

Ionization Reaction	K_b at 25 °C
$(CH_3)_2NH + H_2O \rightleftharpoons (CH_3)_2NH_2^+ + OH^-$	5.9×10^{-4}
$CH_3NH_2 + H_2O \rightleftharpoons CH_3NH_3^+ + OH^-$	4.4×10^{-4}
$(CH_3)_3N + H_2O \rightleftharpoons (CH_3)_3NH^+ + OH^-$	6.3×10^{-5}
$NH_3 + H_2O \rightleftharpoons NH_4^+ + OH^-$	1.8×10^{-5}
$C_6H_5NH_2 + H_2O \rightleftharpoons C_6N_5NH_3^+ + OH^-$	4.3×10^{-10}

The Relative Strengths of Strong Acids and Bases

Strong acids, such as HCl, HBr, and HI, all exhibit the same strength in water. The water molecule is such a strong base compared to the conjugate bases Cl^-, Br^-, and I^- that ionization of these strong acids is essentially complete in aqueous solutions. In solvents less basic than water, we find HCl, HBr, and HI differ markedly in their tendency to give up a proton to the solvent. For example, when dissolved in ethanol (a weaker base than water), the extent of ionization increases in the order HCl < HBr < HI, and so HI is demonstrated to be the strongest of these acids. The inability to discern differences in strength among strong acids dissolved in water is known as the leveling effect of water.

Water also exerts a leveling effect on the strengths of strong bases. For example, the oxide ion, O^{2-}, and the amide ion, NH_2^-, are such strong bases that they react completely with water:

$$O^{2-}(aq) + H_2O(l) \longrightarrow OH^-(aq) + OH^-(aq) \tag{13.3.21}$$

$$NH_2^-(aq) + H_2O(l) \longrightarrow NH_3(aq) + OH^-(aq) \tag{13.3.22}$$

Thus, O^{2-} and NH_2^- appear to have the same base strength in water; they both give a 100% yield of hydroxide ion.

In the absence of any leveling effect, the acid strength of binary compounds of hydrogen with nonmetals (A) increases as the H-A bond strength decreases down a group in the periodic table. For group 17, the order of increasing acidity is HF < HCl < HBr < HI. Likewise, for group 16, the order of increasing acid strength is $H_2O < H_2S < H_2Se < H_2Te$. Across a row in the periodic table, the acid strength of binary hydrogen compounds increases with increasing electronegativity of the nonmetal atom because the polarity of the H-A bond increases. Thus, the order of increasing acidity (for removal of one proton) across the second row is $CH_4 < NH_3 < H_2O <$ HF; across the third row, it is $SiH_4 < PH_3 < H_2S <$ HCl (see Figure **13.3.6**).

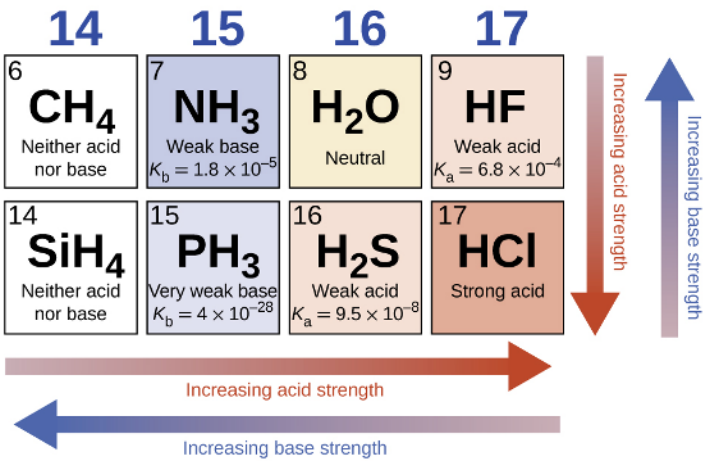

Figure **13.3.6**: As you move from left to right and down the periodic table, the acid strength increases. As you move from right to left and up, the base strength increases.

Compounds containing oxygen and one or more hydroxyl (OH) groups can be acidic, basic, or amphoteric, depending on the position in the periodic table of the central atom E, the atom bonded to the hydroxyl group. Such compounds have the general formula $O_nE(OH)_m$, and include sulfuric acid, $O_2S(OH)_2$, sulfurous acid, $OS(OH)_2$, nitric acid, O_2NOH, perchloric acid, O_3ClOH, aluminum hydroxide, $Al(OH)_3$, calcium hydroxide, $Ca(OH)_2$, and potassium hydroxide, KOH:

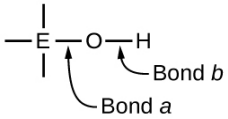

If the central atom, E, has a low electronegativity, its attraction for electrons is low. Little tendency exists for the central atom to form a strong covalent bond with the oxygen atom, and bond *a* between the element and oxygen is more readily broken than bond *b* between oxygen and hydrogen. Hence bond *a* is ionic, hydroxide ions are released to the solution, and the material behaves as a base—this is the case with $Ca(OH)_2$ and KOH. Lower electronegativity is characteristic of the more metallic elements; hence, the metallic elements form ionic hydroxides that are by definition basic compounds.

If, on the other hand, the atom E has a relatively high electronegativity, it strongly attracts the electrons it shares with the oxygen atom, making bond *a* relatively strongly covalent. The oxygen-hydrogen bond, bond *b*, is thereby weakened because electrons are displaced toward E. Bond *b* is polar and readily releases hydrogen ions to the solution, so the material behaves as an acid. High electronegativities are characteristic of the more nonmetallic elements. Thus, nonmetallic elements form covalent compounds containing acidic −OH groups that are called oxyacids.

Increasing the oxidation number of the central atom E also increases the acidity of an oxyacid because this increases the attraction of E for the electrons it shares with oxygen and thereby weakens the O-H bond. Sulfuric acid, H_2SO_4, or $O_2S(OH)_2$ (with a sulfur oxidation number of +6), is more acidic than sulfurous acid, H_2SO_3, or $OS(OH)_2$ (with a sulfur oxidation number of +4). Likewise nitric acid, HNO_3, or O_2NOH (N oxidation number = +5), is more acidic than nitrous acid, HNO_2, or ONOH (N oxidation number = +3). In each of these pairs, the oxidation number of the central atom is larger for the stronger acid (Figure **13.3.7**).

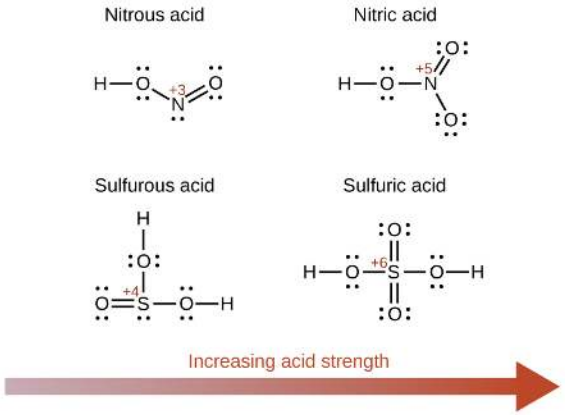

Figure **13.3.7**: As the oxidation number of the central atom E increases, the acidity also increases.

Hydroxy compounds of elements with intermediate electronegativities and relatively high oxidation numbers (for example, elements near the diagonal line separating the metals from the nonmetals in the periodic table) are usually amphoteric. This means that the hydroxy compounds act as acids when they react with strong bases and as bases when they react with strong acids. The amphoterism of aluminum hydroxide, which commonly exists as the hydrate $Al(H_2O)_3(OH)_3$, is reflected in its solubility in both strong acids and strong bases. In strong bases, the relatively insoluble hydrated aluminum hydroxide, $Al(H_2O)_3(OH)_3$, is converted into the soluble ion, $\mathbf{[Al(H_2O)_2(OH)_4]^-}$, by reaction with hydroxide ion:

$$\mathbf{[Al(H_2O)_3(OH)_3}(aq) + \mathbf{OH^-}(aq) \rightleftharpoons \mathbf{H_2O}(l) + \mathbf{[Al(H_2O)_2(OH)_4]^-}(aq) \tag{13.3.23}$$

In this reaction, a proton is transferred from one of the aluminum-bound H_2O molecules to a hydroxide ion in solution. The $Al(H_2O)_3(OH)_3$ compound thus acts as an acid under these conditions. On the other hand, when dissolved in strong acids, it is converted to the soluble ion $\mathbf{[Al(H_2O)_6]^{3+}}$ by reaction with hydronium ion:

$$\mathbf{3\,H_3O^+}(aq) + \mathbf{Al(H_2O)_3(OH)_3}(aq) \rightleftharpoons \mathbf{Al(H_2O)_6^{3+}}(aq) + \mathbf{3\,H_2O}(l) \tag{13.3.24}$$

In this case, protons are transferred from hydronium ions in solution to $Al(H_2O)_3(OH)_3$, and the compound functions as a base.

Summary

The strengths of Brønsted-Lowry acids and bases in aqueous solutions can be determined by their acid or base ionization constants. Stronger acids form weaker conjugate bases, and weaker acids form stronger conjugate bases. Thus strong acids are completely ionized in aqueous solution because their conjugate bases are weaker bases than water. Weak acids are only partially ionized because their conjugate bases are strong enough to compete successfully with water for possession of protons. Strong bases react with water to quantitatively form hydroxide ions. Weak bases give only small amounts of hydroxide ion. The strengths of the binary acids increase from left to right across a period of the periodic table ($CH_4 < NH_3 < H_2O < HF$), and they increase down a group ($HF < HCl < HBr < HI$). The strengths of oxyacids that contain the same central element increase as the oxidation number of the element increases ($H_2SO_3 < H_2SO_4$). The strengths of oxyacids also increase as the electronegativity of the central element increases [$H_2SeO_4 < H_2SO_4$].

Key Equations

- $K_a = \dfrac{[H3O+][A-]}{[HA]}$
- $K_b = \dfrac{[HB+][OH-]}{[B]}$
- $K_a \times K_b = 1.0 \times 10^{-14} = K_w$ (at room temperature)
- $\text{Percent ionization} = \dfrac{[H3O+]_{eq}}{[HA]_0} \times 100$

Glossary

acid ionization constant (K_a)

equilibrium constant for the ionization of a weak acid

base ionization constant (K_b)

equilibrium constant for the ionization of a weak base

leveling effect of water

any acid stronger than H_3O^+, or any base stronger than OH^- will react with water to form H_3O^+, or OH^-, respectively; water acts as a base to make all strong acids appear equally strong, and it acts as an acid to make all strong bases appear equally strong

oxyacid

compound containing a nonmetal and one or more hydroxyl groups

Contributors

- Paul Flowers (University of North Carolina - Pembroke), Klaus Theopold (University of Delaware) and Richard Langley (Stephen F. Austin State University) with contributing authors. Textbook content produced by OpenStax College is licensed under a Creative Commons Attribution License 4.0 license. Download for free at http://cnx.org/contents/85abf193-2bd...a7ac8df6@9.110).

This page titled 13.3: Relative Strengths of Acids and Bases is shared under a CC BY license and was authored, remixed, and/or curated by OpenStax.

13.4: Hydrolysis of Salt Solutions

Learning Objectives

- Predict whether a salt solution will be acidic, basic, or neutral
- Calculate the concentrations of the various species in a salt solution
- Describe the process that causes solutions of certain metal ions to be acidic

As we have seen in the section on chemical reactions, when an acid and base are mixed, they undergo a neutralization reaction. The word “neutralization” seems to imply that a stoichiometrically equivalent solution of an acid and a base would be neutral. This is sometimes true, but the salts that are formed in these reactions may have acidic or basic properties of their own, as we shall now see.

Acid-Base Neutralization

A solution is neutral when it contains equal concentrations of hydronium and hydroxide ions. When we mix solutions of an acid and a base, an acid-base neutralization reaction occurs. However, even if we mix stoichiometrically equivalent quantities, we may find that the resulting solution is not neutral. It could contain either an excess of hydronium ions or an excess of hydroxide ions because the nature of the salt formed determines whether the solution is acidic, neutral, or basic. The following four situations illustrate how solutions with various pH values can arise following a neutralization reaction using stoichiometrically equivalent quantities:

1. A strong acid and a strong base, such as HCl(aq) and NaOH(aq) will react to form a neutral solution since the conjugate partners produced are of negligible strength:

$$\mathrm{HCl}(aq) + \mathrm{NaOH}(aq) \rightleftharpoons \mathrm{NaCl}(aq) + \mathrm{H_2O}(l)$$

2. A strong acid and a weak base yield a weakly acidic solution, not because of the strong acid involved, but because of the conjugate acid of the weak base.
3. A weak acid and a strong base yield a weakly basic solution. A solution of a weak acid reacts with a solution of a strong base to form the conjugate base of the weak acid and the conjugate acid of the strong base. The conjugate acid of the strong base is a weaker acid than water and has no effect on the acidity of the resulting solution. However, the conjugate base of the weak acid is a weak base and ionizes slightly in water. This increases the amount of hydroxide ion in the solution produced in the reaction and renders it slightly basic.
4. A weak acid plus a weak base can yield either an acidic, basic, or neutral solution. This is the most complex of the four types of reactions. When the conjugate acid and the conjugate base are of unequal strengths, the solution can be either acidic or basic, depending on the relative strengths of the two conjugates. Occasionally the weak acid and the weak base will have the *same* strength, so their respective conjugate base and acid will have the same strength, and the solution will be neutral. To predict whether a particular combination will be acidic, basic or neutral, tabulated K values of the conjugates must be compared.

Stomach Antacids

Our stomachs contain a solution of roughly 0.03 M HCl, which helps us digest the food we eat. The burning sensation associated with heartburn is a result of the acid of the stomach leaking through the muscular valve at the top of the stomach into the lower reaches of the esophagus. The lining of the esophagus is not protected from the corrosive effects of stomach acid the way the lining of the stomach is, and the results can be very painful. When we have heartburn, it feels better if we reduce the excess acid in the esophagus by taking an antacid. As you may have guessed, antacids are bases. One of the most common antacids is calcium carbonate, $CaCO_3$. The reaction,

$$CaCO_3(s) + 2HCl(aq) \rightleftharpoons CaCl_2(aq) + H_2O(l) + CO_2(g)$$

not only neutralizes stomach acid, it also produces $CO_2(g)$, which may result in a satisfying belch.

Milk of Magnesia is a suspension of the sparingly soluble base magnesium hydroxide, $Mg(OH)_2$. It works according to the reaction:

$$Mg(OH)_2(s) \rightleftharpoons Mg^{2+}(aq) + 2OH^-(aq)$$

The hydroxide ions generated in this equilibrium then go on to react with the hydronium ions from the stomach acid, so that :

$$H_3O^+ + OH^- \rightleftharpoons 2H_2O(l)$$

This reaction does not produce carbon dioxide, but magnesium-containing antacids can have a laxative effect. Several antacids have aluminum hydroxide, $Al(OH)_3$, as an active ingredient. The aluminum hydroxide tends to cause constipation, and some antacids use aluminum hydroxide in concert with magnesium hydroxide to balance the side effects of the two substances.

Culinary Aspects of Chemistry

Cooking is essentially synthetic chemistry that happens to be safe to eat. There are a number of examples of acid-base chemistry in the culinary world. One example is the use of baking soda, or sodium bicarbonate in baking. $NaHCO_3$ is a base. When it reacts with an acid such as lemon juice, buttermilk, or sour cream in a batter, bubbles of carbon dioxide gas are formed from decomposition of the resulting carbonic acid, and the batter "rises." Baking powder is a combination of sodium bicarbonate, and one or more acid salts that react when the two chemicals come in contact with water in the batter.

Many people like to put lemon juice or vinegar, both of which are acids, on cooked fish (Figure **13.4.1**). It turns out that fish have volatile amines (bases) in their systems, which are neutralized by the acids to yield involatile ammonium salts. This reduces the odor of the fish, and also adds a "sour" taste that we seem to enjoy.

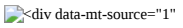

Figure **13.4.1**: A neutralization reaction takes place between citric acid in lemons or acetic acid in vinegar, and the bases in the flesh of fish.

Pickling is a method used to preserve vegetables using a naturally produced acidic environment. The vegetable, such as a cucumber, is placed in a sealed jar submerged in a brine solution. The brine solution favors the growth of beneficial bacteria and suppresses the growth of harmful bacteria. The beneficial bacteria feed on starches in the cucumber and produce lactic acid as a waste product in a process called fermentation. The lactic acid eventually increases the acidity of the brine to a level that kills any harmful bacteria, which require a basic environment. Without the harmful bacteria consuming the cucumbers they are able to last much longer than if they were unprotected. A byproduct of the pickling process changes the flavor of the vegetables with the acid making them taste sour.

Salts of Weak Bases and Strong Acids

When we neutralize a weak base with a strong acid, the product is a salt containing the conjugate acid of the weak base. This conjugate acid is a weak acid. For example, ammonium chloride, NH_4Cl, is a salt formed by the reaction of the weak base ammonia with the strong acid HCl:

$$\mathrm{NH_3}(aq) + \mathrm{HCl}(aq) \longrightarrow \mathrm{NH_4Cl}(aq)$$

A solution of this salt contains ammonium ions and chloride ions. The chloride ion has no effect on the acidity of the solution since HCl is a strong acid. Chloride is a very weak base and will not accept a proton to a measurable extent. However, the ammonium ion, the conjugate acid of ammonia, reacts with water and increases the hydronium ion concentration:

$$\mathrm{NH_4^+}(aq) + \mathrm{H_2O}(l) \rightleftharpoons \mathrm{H_3O^+}(aq) + \mathrm{NH_3}(aq)$$

The equilibrium equation for this reaction is simply the ionization constant. K_a, for the acid $\mathrm{NH_4^+}$:

$$\frac{[H3O+][NH3]}{[NH4+]} = K_a$$

We will not find a value of K_a for the ammonium ion in Table E1. However, it is not difficult to determine K_a for $\mathrm{NH_4^+}$ from the value of the ionization constant of water, K_w, and K_b, the ionization constant of its conjugate base, NH_3, using the following relationship:

$$K_w = K_a \times K_b$$

This relation holds for any base and its conjugate acid or for any acid and its conjugate base.

Example 13.4.1: pH of a Solution of a Salt of a Weak Base and a Strong Acid

Aniline is an amine that is used to manufacture dyes. It is isolated as aniline hydrochloride, $[C_6H_5NH_3^+]Cl$, a salt prepared by the reaction of the weak base aniline and hydrochloric acid. What is the pH of a 0.233 *M* solution of aniline hydrochloride?

$$C_6H_5NH_3^+(aq) + H_2O(l) \rightleftharpoons H_3O^+(aq) + C_6H_5NH_2(aq)$$

Solution

The new step in this example is to determine K_a for the $C_6H_5NH_3^+$ ion. The $C_6H_5NH_3^+$ ion is the conjugate acid of a weak base. The value of K_a for this acid is not listed in Table E1, but we can determine it from the value of K_b for aniline, $C_6H_5NH_2$, which is given as 4.6×10^{-10} :

$$K_a(\text{for } C_6H_5NH_3^+) \times K_b(\text{for } C_6H_5NH_2) = K_w = 1.0 \times 10^{-14}$$

$$K_a(\text{for } C_6H_5NH_3^+) = \frac{K_w}{K_b(\text{for } C_6H_5NH_2)} = \frac{1.0 \times 10^{-14}}{4.6 \times 10^{-10}} = 2.3 \times 10^{-5}$$

Now we have the ionization constant and the initial concentration of the weak acid, the information necessary to determine the equilibrium concentration of H_3O^+, and the pH:

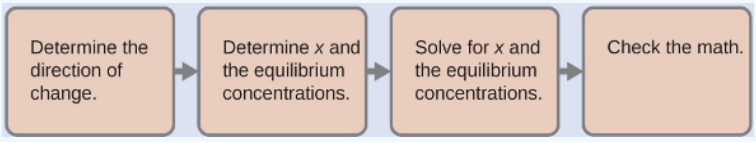

Four tan rectangles are shown that are connected with right pointing arrows. The first is labeled “Determine the direction of change.” The second is labeled “Determine x and the equilibrium concentrations.” The third is labeled “Solve for x and the equilibrium concentrations.” The fourth is labeled “Check the math.”

With these steps we find $[H_3O^+] = 2.3 \times 10^{-3}$ *M* and pH = 2.64

Exercise 13.4.1

a. Do the calculations and show that the hydronium ion concentration for a 0.233-*M* solution of $C_6H_5NH_3^+$ is 2.3×10^{-3} and the pH is 2.64.

b. What is the hydronium ion concentration in a 0.100-*M* solution of ammonium nitrate, NH_4NO_3, a salt composed of the ions NH_4^+ and NO_3^-. Use the data in Table E1 to determine K_b for the ammonium ion. Which is the stronger acid $C_6H_5NH_3^+$ or NH_4^+?

Answer a

$K_a(\text{for } NH_4^+) = 5.6 \times 10^{-10}$, $[H_3O^+]$ = 7.5 × 10−6 M

Answer b

$C_6H_5NH_3^+$ is the stronger acid (a) (b) .

Salts of Weak Acids and Strong Bases

When we neutralize a weak acid with a strong base, we get a salt that contains the conjugate base of the weak acid. This conjugate base is usually a weak base. For example, sodium acetate, $NaCH_3CO_2$, is a salt formed by the reaction of the weak acid acetic acid with the strong base sodium hydroxide:

$$CH_3CO_2H(aq) + NaOH(aq) \longrightarrow NaCH_3CO_2(aq) + H_2O(aq)$$

A solution of this salt contains sodium ions and acetate ions. The sodium ion has no effect on the acidity of the solution. However, the acetate ion, the conjugate base of acetic acid, reacts with water and increases the concentration of hydroxide ion:

$$CH_3CO_2^-(aq) + H_2O(l) \rightleftharpoons CH_3CO_2H(aq) + OH^-(aq)$$

The equilibrium equation for this reaction is the ionization constant, K_b, for the base $CH_3CO_2^-$. The value of K_b can be calculated from the value of the ionization constant of water, K_w, and K_a, the ionization constant of the conjugate acid of the anion using the equation:

$$_w = K_a \times K_b$$

For the acetate ion and its conjugate acid we have:

$$K_b(\text{for } _{32}CHCO^-) = \frac{K_w}{K_a(\text{for } CH_3CO_2H)} = \frac{1.0 \times 10^{-14}}{1.8 \times 10^{-5}} = 5.6 \times 10^{-10}$$

Some handbooks do not report values of K_b. They only report ionization constants for acids. If we want to determine a K_b value using one of these handbooks, we must look up the value of K_a for the conjugate acid and convert it to a K_b value.

Example 13.4.2: Equilibrium of a Salt of a Weak Acid and a Strong Base

Determine the acetic acid concentration in a solution with $[CH_3CO_2^-] = 0.050\ M$ and $[OH^-] = 2.5 \times 10^{-6}\ M$ at equilibrium. The reaction is:

$$CH_3CO_2^-(aq) + H_2O(l) \rightleftharpoons CH_3CO_2H(aq) + OH^-(aq)$$

Solution

We are given two of three equilibrium concentrations and asked to find the missing concentration. If we can find the equilibrium constant for the reaction, the process is straightforward.

The acetate ion behaves as a base in this reaction; hydroxide ions are a product. We determine K_b as follows:

$$K_b(\text{for } _{32}CHCO^-) = \frac{K_w}{K_a(\text{for } CH_3CO_2H)} = \frac{1.0 \times 10^{-14}}{1.8 \times 10^{-5}} = 5.6 \times 10^{-10}$$

Now find the missing concentration:

$$K_b = \frac{[CH3CO2H][OH-]}{[CH3CO2-]} = 5.6 \times 10^{-10}$$

$$= \frac{[CH_3CO_2H](2.5 \times 10^{-6})}{(0.050)} = 5.6 \times 10^{-10}$$

Solving this equation we get $[CH_3CO_2H] = 1.1 \times 10^{-5}\ M$.

Exercise 13.4.2

What is the pH of a 0.083-M solution of CN^-? Use 4.9×10^{-10} as K_a for HCN. Hint: We will probably need to convert pOH to pH or find $[H_3O^+]$ using $[OH^-]$ in the final stages of this problem.

Answer

11.16

Equilibrium in a Solution of a Salt of a Weak Acid and a Weak Base

In a solution of a salt formed by the reaction of a weak acid and a weak base, to predict the pH, we must know both the K_a of the weak acid and the K_b of the weak base. If $K_a > K_b$, the solution is acidic, and if $K_b > K_a$, the solution is basic.

Example 13.4.3: Determining the Acidic or Basic Nature of Salts

Determine whether aqueous solutions of the following salts are acidic, basic, or neutral:

a. KBr
b. $NaHCO_3$

c. NH_4Cl
d. Na_2HPO_4
e. NH_4F

Solution

Consider each of the ions separately in terms of its effect on the pH of the solution, as shown here:

a. The K^+ cation and the Br^- anion are both spectators, since they are the cation of a strong base (KOH) and the anion of a strong acid (HBr), respectively. The solution is neutral.
b. The Na^+ cation is a spectator, and will not affect the pH of the solution; the $\mathbf{HCO_3^-}$ anion is amphiprotic.The K_a of $\mathbf{HCO_3^-}$ is 4.7×10^{-11}, so the K_b of its conjugate base is $\frac{\mathbf{1.0 \times 10^{-14}}}{\mathbf{4.7 \times 10^{-11}}} = \mathbf{2.1 \times 10^{-4}}$. Since $K_b >> K_a$, the solution is basic.
c. The $\mathbf{NH_4^+}$ ion is acidic and the Cl^- ion is a spectator. The solution will be acidic.
d. The Na^+ ion is a spectator and will not affect the pH of the solution, while the $\mathbf{HPO_4^{2-}}$ ion is amphiprotic. The K_a of $\mathbf{HPO_4^{2-}}$ is 4.2×10^{-13} and its K_b is $\frac{\mathbf{1.0 \times 10^{-14}}}{\mathbf{4.2 \times 10^{-13}}} = \mathbf{2.4 \times 10^{-2}}$. Because $K_b >> K_a$, the solution is basic.
e. The $\mathbf{NH_4^+}$ ion is listed as being acidic, and the F^- ion is listed as a base, so we must directly compare the K_a and the K_b of the two ions. K_a of $\mathbf{NH_4^+}$ is 5.6×10^{-10}, which seems very small, yet the K_b of F^- is 1.4×10^{-11}, so the solution is acidic, since $K_a > K_b$.

? Exercise 13.4.3

Determine whether aqueous solutions of the following salts are acidic, basic, or neutral:

a. K_2CO_3
b. $CaCl_2$
c. KH_2PO_4
d. $(NH_4)_2CO_3$
e. $AlBr_3$

Answer a

basic

Answer b

neutral

Answer c

acidic

Answer d

basic

Answer e

acidic

The Ionization of Hydrated Metal Ions

If we measure the pH of the solutions of a variety of metal ions we will find that these ions act as weak acids when in solution. The aluminum ion is an example. When aluminum nitrate dissolves in water, the aluminum ion reacts with water to give a hydrated aluminum ion, $\mathbf{Al(H_2O)_6^{3+}}$, dissolved in bulk water. What this means is that the aluminum ion has the strongest interactions with the six closest water molecules (the so-called first solvation shell), even though it does interact with the other water molecules surrounding this $\mathbf{Al(H_2O)_6^{3+}}$ cluster as well:

$$\mathbf{Al(NO_3)_3}(s) + \mathbf{6\,H_2O}(l) \longrightarrow \mathbf{Al(H_2O)_6^{3+}}(aq) + \mathbf{3\,NO_3^-}(aq)$$

We frequently see the formula of this ion simply as "$Al^{3+}(aq)$", without explicitly noting the six water molecules that are the closest ones to the aluminum ion and just describing the ion as being solvated in water (hydrated). This is similar to the simplification of the formula of the hydronium ion, H_3O^+ to H^+. However, in this case, the hydrated aluminum ion is a weak acid (Figure **13.4.2**) and donates a proton to a water molecule. Thus, the hydration becomes important and we may use formulas that show the extent of hydration:

$$Al(H_2O)_6{}^{3+}(aq) + H_2O(l) \rightleftharpoons H_3O^+(aq) + Al(H_2O)_5(OH)^{2+}(aq) \quad K_a = 1.4 \times 10^{-5}$$

As with other polyprotic acids, the hydrated aluminum ion ionizes in stages, as shown by:

$$Al(H_2O)_6{}^{3+}(aq) + H_2O(l) \rightleftharpoons H_3O^+(aq) + Al(H_2O)_5(OH)^{2+}(aq)$$

$$Al(H_2O)_5(OH)^{2+}(aq) + H_2O(l) \rightleftharpoons H_3O^+(aq) + Al(H_2O)_4(OH)_2{}^{+}(aq)$$

$$Al(H_2O)_4(OH)_2{}^{+}(aq) + H_2O(l) \rightleftharpoons H_3O^+(aq) + Al(H_2O)_3(OH)_3(aq)$$

Note that some of these aluminum species are exhibiting amphiprotic behavior, since they are acting as acids when they appear on the left side of the equilibrium expressions and as bases when they appear on the right side.

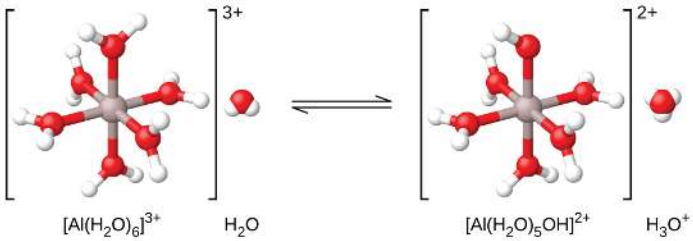

Figure **13.4.2**: When an aluminum ion reacts with water, the hydrated aluminum ion becomes a weak acid.

A reaction is shown using ball and stick models. On the left, inside brackets with a superscript of 3 plus outside to the right is structure labeled "[A l (H subscript 2 O) subscript 6] superscript 3 plus." Inside the brackets is s central grey atom to which 6 red atoms are bonded in an arrangement that distributes them evenly about the central grey atom. Each red atom has two smaller white atoms attached in a forked or bent arrangement. Outside the brackets to the right is a space-filling model that includes a red central sphere with two smaller white spheres attached in a bent arrangement. Beneath this structure is the label "H subscript 2 O." A double sided arrow follows. Another set of brackets follows to the right of the arrows which have a superscript of two plus outside to the right. The structure inside the brackets is similar to that on the left, except a white atom is removed from the structure. The label below is also changed to "[A l (H subscript 2 O) subscript 5 O H] superscript 2 plus." To the right of this structure and outside the brackets is a space filling model with a central red sphere to which 3 smaller white spheres are attached. This structure is labeled "H subscript 3 O superscript plus."

However, the ionization of a cation carrying more than one charge is usually not extensive beyond the first stage. Additional examples of the first stage in the ionization of hydrated metal ions are:

$$Fe(H_2O)_6{}^{3+}(aq) + H_2O(l) \rightleftharpoons H_3O^+(aq) + Fe(H_2O)_5(OH)^{2+}(aq) \quad K_a = 2.74$$

$$Cu(H_2O)_6{}^{2+}(aq) + H_2O(l) \rightleftharpoons H_3O^+(aq) + Cu(H_2O)_5(OH)^{+}(aq) \quad K_a = 6.3$$

$$Zn(H_2O)_4{}^{2+}(aq) + H_2O(l) \rightleftharpoons H_3O^+(aq) + Zn(H_2O)_3(OH)^{+}(aq) \quad K_a = 9.6$$

✔ Example 13.4.4: Hydrolysis of $[Al(H_2O)_6]^{3+}$

Calculate the pH of a 0.10-*M* solution of aluminum chloride, which dissolves completely to give the hydrated aluminum ion $[Al(H_2O)_6]^{3+}$ in solution.

Solution

In spite of the unusual appearance of the acid, this is a typical acid ionization problem.

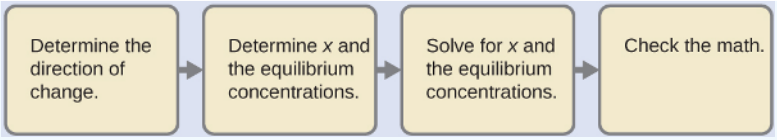

A reaction is shown using ball and stick models. On the left, inside brackets with a superscript of 3 plus outside to the right is structure labeled “[A l (H subscript 2 O) subscript 6] superscript 3 plus.” Inside the brackets is s central grey atom to which 6 red atoms are bonded in an arrangement that distributes them evenly about the central grey atom. Each red atom has two smaller white atoms attached in a forked or bent arrangement. Outside the brackets to the right is a space-filling model that includes a red central sphere with two smaller white spheres attached in a bent arrangement. Beneath this structure is the label “H subscript 2 O.” A double sided arrow follows. Another set of brackets follows to the right of the arrows which have a superscript of two plus outside to the right. The structure inside the brackets is similar to that on the left, except a white atom is removed from the structure. The label below is also changed to “[A l (H subscript 2 O) subscript 5 O H] superscript 2 plus.” To the right of this structure and outside the brackets is a space filling model with a central red sphere to which 3 smaller white spheres are attached. This structure is labeled “H subscript 3 O superscript plus.”

1. *Determine the direction of change*. The equation for the reaction and K_a are:

$$\mathrm{Al(H_2O)_6^{3+}}(aq) + \mathrm{H_2O}(l) \rightleftharpoons \mathrm{H_3O^+}(aq) + \mathrm{Al(H_2O)_5(OH)^{2+}}(aq) \quad K_a = 1.4 \times 10^{-5}$$

The reaction shifts to the right to reach equilibrium.

2. *Determine x and equilibrium concentrations.* Use the table

:

	$\mathrm{Al(H_2O)_6^{3+}} + \mathrm{H_2O} \rightleftharpoons \mathrm{H_3O^+} + \mathrm{Al(H_2O)_5(OH)^{2+}}$		
Initial concentration (*M*)	0.10	~0	0
Change (*M*)	$-x$	x	x
Equilibrium constant (*M*)	$0.10 - x$	x	x

This table has two main columns and four rows. The first row for the first column does not have a heading and then has the following in the first column: Initial concentration (M), Change (M), Equilibrium concentration (M). The second column has the header of “A l (H subscript 2 O) subscript 6 superscript 3 positive sign plus H subscript 2 O equilibrium arrow H subscript 3 O superscript positive sign plus A l (H subscript 2 O) subscript 5 (O H) superscript 2 positive sign.” Under the second column is a subgroup of four columns and three rows. The first column has the following: 0.10 (which appears in red), negative x, 0.10 minus x. The second column is blank. The third column has the following: approximately 0, x, x. The fourth column has the following: 0, x, x.

Solve for x and the equilibrium concentrations. Substituting the expressions for the equilibrium concentrations into the equation for the ionization constant yields:

1.

$$K_a = \frac{[H3O+][Al(H2O)5(OH)^2+]}{[Al(H2O)6^3+]}$$

$$= \frac{(x)(x)}{0.10 - x} = 1.4 \times 10^{-5}$$

Solving this equation gives:

$$x = 1.2 \times 10^{-3}\ M$$

From this we find:

$$[\mathrm{H_3O^+}] = 0 + x = 1.2 \times 10^{-3}\ M$$

$$\mathrm{pH} = -\log[\mathrm{H_3O^+}] = 2.92 (\text{an acidic solution})$$

Check the work. The arithmetic checks; when 1.2×10^{-3} *M* is substituted for *x*, the result = K_a.

Exercise 13.4.4

What is $[Al(H_2O)_5(OH)^{2+}]$ in a 0.15-*M* solution of $Al(NO_3)_3$ that contains enough of the strong acid HNO_3 to bring $[H_3O^+]$ to 0.10 *M*?

Answer

$2.1 \times 10^{-5}\ M$

The constants for the different stages of ionization are not known for many metal ions, so we cannot calculate the extent of their ionization. However, practically all hydrated metal ions other than those of the alkali metals ionize to give acidic solutions. Ionization increases as the charge of the metal ion increases or as the size of the metal ion decreases.

Summary

The characteristic properties of aqueous solutions of Brønsted-Lowry acids are due to the presence of hydronium ions; those of aqueous solutions of Brønsted-Lowry bases are due to the presence of hydroxide ions. The neutralization that occurs when aqueous solutions of acids and bases are combined results from the reaction of the hydronium and hydroxide ions to form water. Some salts formed in neutralization reactions may make the product solutions slightly acidic or slightly basic. Solutions that contain salts or hydrated metal ions have a pH that is determined by the extent of the hydrolysis of the ions in the solution. The pH of the solutions may be calculated using familiar equilibrium techniques, or it may be qualitatively determined to be acidic, basic, or neutral depending on the relative K_a and K_b of the ions involved.

This page titled 13.4: Hydrolysis of Salt Solutions is shared under a CC BY license and was authored, remixed, and/or curated by OpenStax.

- **14.4: Hydrolysis of Salt Solutions** by OpenStax is licensed CC BY 4.0. Original source: https://openstax.org/details/books/chemistry-2e.

13.5: Polyprotic Acids

Learning Objectives

- Extend previously introduced equilibrium concepts to acids and bases that may donate or accept more than one proton

We can classify acids by the number of protons per molecule that they can give up in a reaction. Acids such as $\mathbf{HCl}$, $\mathbf{HNO_3}$, and $\mathbf{HCN}$ that contain one ionizable hydrogen atom in each molecule are called monoprotic acids. Their reactions with water are:

$$\mathbf{HCl}(aq) + \mathbf{H_2O}(l) \longrightarrow \mathbf{H_3O^+}(aq) + \mathbf{Cl^-}(aq) \tag{13.5.1}$$

$$\mathbf{HNO_3}(aq) + \mathbf{H_2O}(l) \longrightarrow \mathbf{H_3O^+}(aq) + \mathbf{NO_3^-}(aq) \tag{13.5.2}$$

$$\mathbf{HCN}(aq) + \mathbf{H_2O}(l) \longrightarrow \mathbf{H_3O^+}(aq) + \mathbf{CN^-}(aq) \tag{13.5.3}$$

Even though it contains four hydrogen atoms, acetic acid, $\mathbf{CH_3CO_2H}$, is also monoprotic because only the hydrogen atom from the carboxyl group ($\mathbf{-COOH}$) reacts with bases:

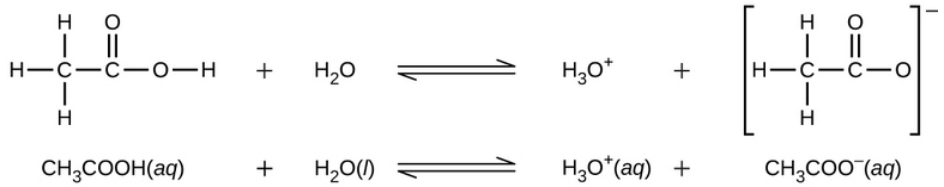

Similarly, monoprotic bases are bases that will accept a single proton.

Diprotic Acids

Diprotic acids contain two ionizable hydrogen atoms per molecule; ionization of such acids occurs in two steps. The first ionization always takes place to a greater extent than the second ionization. For example, sulfuric acid, a strong acid, ionizes as follows:

- **The first ionization is**

$$\mathbf{H_2SO_4}(aq) + \mathbf{H_2O}(l) \rightleftharpoons \mathbf{H_3O^+}(aq) + \mathbf{HSO_4^-}(aq) \tag{13.5.4}$$

with $K_{a1} > 10^2$; *complete dissociation*.

- **The second ionization is**

$$\mathbf{HSO_4^-}(aq) + \mathbf{H_2O}(l) \rightleftharpoons \mathbf{H_3O^+}(aq) + \mathbf{SO_4^{2-}}(aq) \tag{13.5.5}$$

with $K_{a2} = 1.2 \times 10^{-2}$.

This stepwise ionization process occurs for all polyprotic acids. When we make a solution of a weak diprotic acid, we get a solution that contains a mixture of acids. Carbonic acid, $\mathbf{H_2CO_3}$, is an example of a weak diprotic acid. The first ionization of carbonic acid yields hydronium ions and bicarbonate ions in small amounts.

- **First Ionization**

$$\mathbf{H_2CO_3}(aq) + \mathbf{H_2O}(l) \rightleftharpoons \mathbf{H_3O^+}(aq) + \mathbf{HCO_3^-}(aq) \tag{13.5.6}$$

with

$$K_{\mathbf{H_2CO_3}} = \frac{[H3O+][HCO3-]}{[H2CO3]} = 4.3 \times 10^{-7} \tag{13.5.7}$$

The bicarbonate ion can also act as an acid. It ionizes and forms hydronium ions and carbonate ions in even smaller quantities.

- **Second Ionization**

$$\mathbf{HCO_3^-}(aq) + \mathbf{H_2O}(l) \rightleftharpoons \mathbf{H_3O^+}(aq) + \mathbf{CO_3^{2-}}(aq) \tag{13.5.8}$$

with

$$K_{HCO_3^-} = \frac{[H3O+][CO3^{2-}]}{[HCO3-]} = 4.7 \times 10^{-11} \tag{13.5.9}$$

$K_{H_2CO_3}$ is larger than $K_{HCO_3^-}$ by a factor of 10^4, so H_2CO_3 is the dominant producer of hydronium ion in the solution. This means that little of the HCO_3^- formed by the ionization of H_2CO_3 ionizes to give hydronium ions (and carbonate ions), and the concentrations of H_3O^+ and HCO_3^- are practically equal in a pure aqueous solution of H_2CO_3.

If the first ionization constant of a weak diprotic acid is larger than the second by a factor of at least 20, it is appropriate to treat the first ionization separately and calculate concentrations resulting from it before calculating concentrations of species resulting from subsequent ionization. This can simplify our work considerably because we can determine the concentration of H_3O^+ and the conjugate base from the first ionization, then determine the concentration of the conjugate base of the second ionization in a solution with concentrations determined by the first ionization.

Example 13.5.1: Ionization of a Diprotic Acid

When we buy soda water (carbonated water), we are buying a solution of carbon dioxide in water. The solution is acidic because CO_2 reacts with water to form carbonic acid, H_2CO_3. What are $[H_3O^+]$, $[HCO_3^-]$, and $[CO_3^{2-}]$ in a saturated solution of CO_2 with an initial $[H_2CO_3] = 0.033\ M$?

$$H_2CO_3(aq) + H_2O(l) \rightleftharpoons H_3O^+(aq) + HCO_3^-(aq) \quad K_{a1} = 4.3 \times 10^{-7} \qquad \text{(equilibrium step 1)}$$

$$HCO_3^-(aq) + H_2O(l) \rightleftharpoons H_3O^+(aq) + CO_3^{2-}(aq) \quad K_{a2} = 4.7 \times 10^{-11} \qquad \text{(equilibrium step 2)}$$

Solution

As indicated by the ionization constants, H_2CO_3 is a much stronger acid than HCO_3^-, so H_2CO_3 is the dominant producer of hydronium ion in solution. Thus there are two parts in the solution of this problem:

1. Using the customary four steps, we determine the concentration of H_3O^+ and HCO_3^- produced by ionization of H_2CO_3.
2. Then we determine the concentration of CO_3^{2-} in a solution with the concentration of H_3O^+ and HCO_3^- determined in (1).

To summarize:

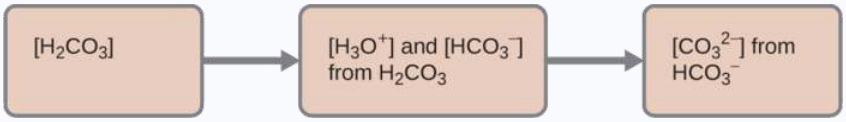

1. First Ionization: Determine the concentrations of H_3O^+ *and* HCO_3^-.

Since equilibrium step 1 is has a much bigger $K_{a1} = 4.3 \times 10^{-7}$ than $K_{a2} = 4.7 \times 10^{-11}$ for equilibrium step 2, we can safely ignore the second ionization step and focus only on the first step (but address it in next part of problem).

$$H_2CO_3(aq) + H_2O(l) \rightleftharpoons H_3O^+(aq) + HCO_3^-(aq) \quad K_{a1} = 4.3 \times 10^{-7} onumber \tag{13.5.10}$$

As for the ionization of any other weak acid:

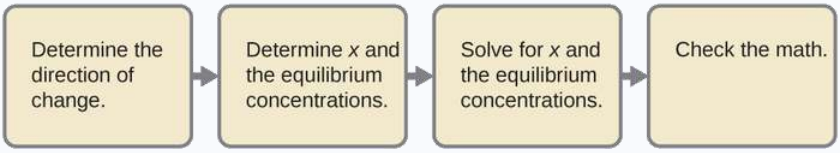

An abbreviated table of changes and concentrations shows:

ICE Table	$H_2CO_3(aq)$	$H_2O(l)$	$H_3O^+(aq)$	$HCO_3^-(aq)$
Initial (M)	$0.033\ M$	-	0	0
Change (M)	$-x$	-	$+x$	$+x$
Equilibrium (M)	$0.033\ M - x$	-	x	x

Substituting the equilibrium concentrations into the equilibrium constant gives us:

$$K_{H_2CO_3} = \frac{[H3O+][HCO3-]}{[H2CO3]} = \frac{(x)(x)}{0.033 - x} = 4.3 \times 10^{-7} onumber \tag{13.5.11}$$

Solving the preceding equation making our standard assumptions gives:

$$x = 1.2 \times 10^{-4} onumber \tag{13.5.12}$$

Thus:

$$[H_2CO_3] = 0.033\ M onumber \tag{13.5.13}$$

$$[H_3O^+] = [HCO_3^-] = 1.2 \times 10^{-4}\ M onumber \tag{13.5.14}$$

2. Second Ionization: Determine the concentration of CO_3^{2-} in a solution at equilibrium.

Since the **equilibrium step 1** is has a much bigger K_a than **equilibrium step 2**, we can the equilibrium conditions calculated from first part of example as the initial conditions for an ICER Table for the **equilibrium step 2**:

$$HCO_3^-(aq) + H_2O(l) \rightleftharpoons H_3O^+(aq) + CO_3^{2-}(aq) onumber \tag{13.5.15}$$

ICE Table	$HCO_3^-(aq)$	$H_2O(l)$	$H_3O^+(aq)$	$CO_3^{2-}(aq)$
Initial (M)	$1.2 \times 10^{-4}\ M$	-	$1.2 \times 10^{-4}\ M$	0
Change (M)	$-y$	-	$+y$	$+y$
Equilibrium (M)	$1.2 \times 10^{-4}\ M - y$	-	$1.2 \times 10^{-4}\ M + y$	y

$$K_{HCO_3^-} = \frac{[H3O+][CO3^2-]}{[HCO3-]} = \frac{(1.2 \times 10^{-4}\ M + y)(y)}{(1.2 \times 10^{-4}\ M - y)}$$

To avoid solving a quadratic equation, we can assume $y \ll 1.2 \times 10^{-4}\ M$ so

$$K_{HCO_3^-} = 4.7 \times 10^{-11} \approx \frac{(1.2 \times 10^{-4}\ M)(y)}{(1.2 \times 10^{-4}\ M)} onumber \tag{13.5.16}$$

Rearranging to solve for y

$$y \approx \frac{(4.7 \times 10^{-11})(1.2 \times 10^{-4}\ M)}{1.2 \times 10^{-4}\ M} onumber \tag{13.5.17}$$

$$[CO_3^{2-}] = y \approx 4.7 \times 10^{-11} onumber \tag{13.5.18}$$

To summarize:

In part 1 of this example, we found that the H_2CO_3 in a 0.033-M solution ionizes slightly and at equilibrium $[H_2CO_3] = 0.033\ M$, $[H_3O^+] = 1.2 \times 10^{-4}$, and $[HCO_3^-] = 1.2 \times 10^{-4}\ M$. In part 2, we determined that $[CO_3^{2-}] = 5.6 \times 10^{-11}\ M$.

Exercise 13.5.2: Hydrogen Sulfide

The concentration of H_2S in a saturated aqueous solution at room temperature is approximately 0.1 *M*. Calculate $[H_3O^+]$, $[HS^-]$, and $[S^{2-}]$ in the solution:

$$H_2S(aq) + H_2O(l) \rightleftharpoons H_3O^+(aq) + HS^-(aq) \quad K_{a1} = 8.9 \times 10^{-8} onumber \tag{13.5.19}$$

$$HS^-(aq) + H_2O(l) \rightleftharpoons H_3O^+(aq) + S^{2-}(aq) \quad K_{a2} = 1.0 \times 10^{-19} onumber \tag{13.5.20}$$

Answer

$[H_2S] = 0.1M$, $[H_3O^+] = [HS^-] = 0.0001\ M$, $[S^{2-}] = 1 \times 10^{-19}\ M$

We note that the concentration of the sulfide ion is the same as K_{a2}. This is due to the fact that each subsequent dissociation occurs to a lesser degree (as acid gets weaker).

Triprotic Acids

A triprotic acid is an acid that has three dissociable protons that undergo stepwise ionization: Phosphoric acid is a typical example:

- **The first ionization is**

$$H_3PO_4(aq) + H_2O(l) \rightleftharpoons H_3O^+(aq) + H_2PO_4^-(aq) \tag{13.5.21}$$

with $K_{a1} = 7.5 \times 10^{-3}$.

- **The second ionization is**

$$H_2PO_4^-(aq) + H_2O(l) \rightleftharpoons H_3O^+(aq) + HPO_4^{2-}(aq) \tag{13.5.22}$$

with $K_{a2} = 6.2 \times 10^{-8}$.

- **The third ionization is**

$$HPO_4^{2-}(aq) + H_2O(l) \rightleftharpoons H_3O^+(aq) + PO_4^{3-}(aq) \tag{13.5.23}$$

with $K_{a3} = 4.2 \times 10^{-13}$.

As with the diprotic acids, the differences in the ionization constants of these reactions tell us that in each successive step the degree of ionization is significantly weaker. This is a general characteristic of polyprotic acids and successive ionization constants often differ by a factor of about 10^5 to 10^6. This set of three dissociation reactions may appear to make calculations of equilibrium concentrations in a solution of H_3PO_4 complicated. However, because the successive ionization constants differ by a factor of 10^5 to 10^6, the calculations can be broken down into a series of parts similar to those for diprotic acids.

Polyprotic bases can accept more than one hydrogen ion in solution. The carbonate ion is an example of a diprotic base, since it can accept up to two protons. Solutions of alkali metal carbonates are quite alkaline, due to the reactions:

$$H_2O(l) + CO_3^{2-}(aq) \rightleftharpoons HCO_3^-(aq) + OH^-(aq) \tag{13.5.24}$$

and

$$H_2O(l) + HCO_3^-(aq) \rightleftharpoons H_2CO_3(aq) + OH^-(aq) \tag{13.5.25}$$

Summary

An acid that contains more than one ionizable proton is a polyprotic acid. The protons of these acids ionize in steps. The differences in the acid ionization constants for the successive ionizations of the protons in a polyprotic acid usually vary by roughly five orders of magnitude. As long as the difference between the successive values of K_a of the acid is greater than about a factor of 20, it is appropriate to break down the calculations of the concentrations of the ions in solution into a series of steps.

Glossary

diprotic acid
acid containing two ionizable hydrogen atoms per molecule. A diprotic acid ionizes in two steps

diprotic base
base capable of accepting two protons. The protons are accepted in two steps

monoprotic acid
acid containing one ionizable hydrogen atom per molecule

stepwise ionization
process in which an acid is ionized by losing protons sequentially

triprotic acid
acid that contains three ionizable hydrogen atoms per molecule; ionization of triprotic acids occurs in three steps

Contributors

- Paul Flowers (University of North Carolina - Pembroke), Klaus Theopold (University of Delaware) and Richard Langley (Stephen F. Austin State University) with contributing authors. Textbook content produced by OpenStax College is licensed under a Creative Commons Attribution License 4.0 license. Download for free at http://cnx.org/contents/85abf193-2bd...a7ac8df6@9.110).

This page titled 13.5: Polyprotic Acids is shared under a CC BY license and was authored, remixed, and/or curated by OpenStax.

13.6: Buffers

Learning Objectives

- Describe the composition and function of acid–base buffers
- Calculate the pH of a buffer before and after the addition of added acid or base

A mixture of a weak acid and its conjugate base (or a mixture of a weak base and its conjugate acid) is called a buffer solution, or a buffer. Buffer solutions resist a change in pH when small amounts of a strong acid or a strong base are added (Figure **13.6.1**). A solution of acetic acid ($\mathbf{CH_3COOH}$ and sodium acetate $\mathbf{CH_3COONa}$) is an example of a buffer that consists of a weak acid and its salt. An example of a buffer that consists of a weak base and its salt is a solution of ammonia ($\mathbf{NH_3\,(aq)}$) and ammonium chloride ($\mathbf{NH_4Cl\,(aq)}$).

Figure **13.6.1**: (a) The unbuffered solution on the left and the buffered solution on the right have the same pH (pH 8); they are basic, showing the yellow color of the indicator methyl orange at this pH. (b) After the addition of 1 mL of a 0.01-M HCl solution, the buffered solution has not detectably changed its pH but the unbuffered solution has become acidic, as indicated by the change in color of the methyl orange, which turns red at a pH of about 4. (credit: modification of work by Mark Ott)

How Buffers Work

A mixture of acetic acid and sodium acetate is acidic because the K_a of acetic acid is greater than the K_b of its conjugate base acetate. It is a buffer because it contains both the weak acid and its salt. Hence, it acts to keep the hydronium ion concentration (and the pH) almost constant by the addition of either a small amount of a strong acid or a strong base. If we add a base such as sodium hydroxide, the hydroxide ions react with the few hydronium ions present. Then more of the acetic acid reacts with water, restoring the hydronium ion concentration almost to its original value:

$$\mathbf{CH_3CO_2H}(aq) + \mathbf{H_2O}(l) \longrightarrow \mathbf{H_3O^+}(aq) + \mathbf{CH_3CO_2^-}(aq)$$

The pH changes very little. If we add an acid such as hydrochloric acid, most of the hydronium ions from the hydrochloric acid combine with acetate ions, forming acetic acid molecules:

$$\mathbf{H_3O^+}(aq) + \mathbf{CH_3CO_2^-}(aq) \longrightarrow \mathbf{CH_3CO_2H}(aq) + \mathbf{H_2O}(l)$$

Thus, there is very little increase in the concentration of the hydronium ion, and the pH remains practically unchanged (Figure **13.6.2**).

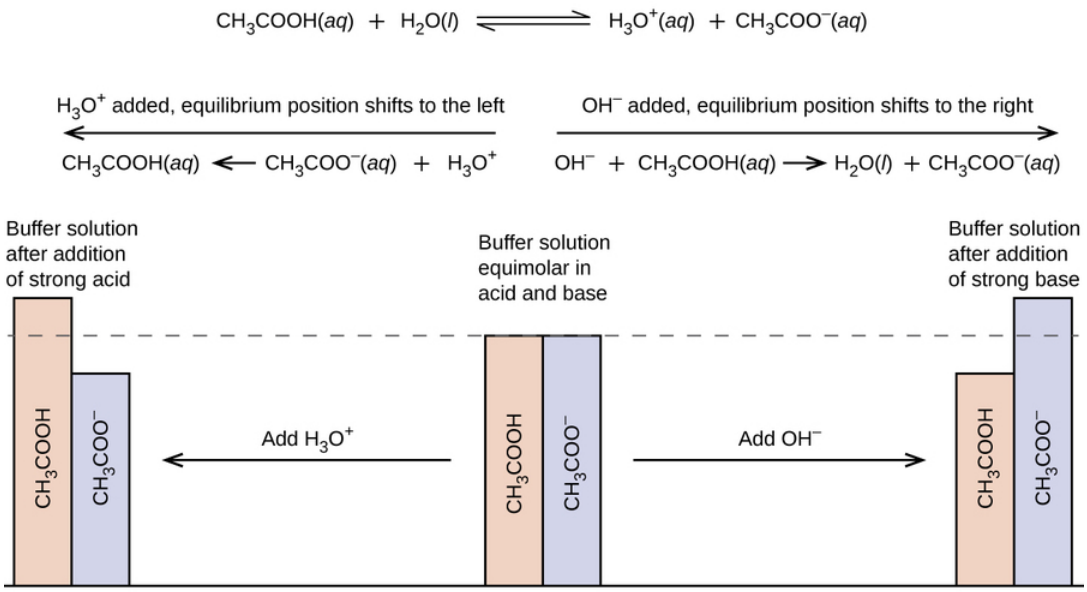

Figure **13.6.2**: This diagram shows the buffer action of these reactions.

A mixture of ammonia and ammonium chloride is basic because the K_b for ammonia is greater than the K_a for the ammonium ion. It is a buffer because it also contains the salt of the weak base. If we add a base (hydroxide ions), ammonium ions in the buffer react with the hydroxide ions to form ammonia and water and reduce the hydroxide ion concentration almost to its original value:

$$\mathbf{NH_4^+}(aq) + \mathbf{OH^-}(aq) \longrightarrow \mathbf{NH_3}(aq) + \mathbf{H_2O}(l)$$

If we add an acid (hydronium ions), ammonia molecules in the buffer mixture react with the hydronium ions to form ammonium ions and reduce the hydronium ion concentration almost to its original value:

$$\mathbf{H_3O^+}(aq) + \mathbf{NH_3}(aq) \longrightarrow \mathbf{NH_4^+}(aq) + \mathbf{H_2O}(l)$$

The three parts of the following example illustrate the change in pH that accompanies the addition of base to a buffered solution of a weak acid and to an unbuffered solution of a strong acid.

Example 13.6.1: pH Changes in Buffered and Unbuffered Solutions

Acetate buffers are used in biochemical studies of enzymes and other chemical components of cells to prevent pH changes that might change the biochemical activity of these compounds.

a. Calculate the pH of an acetate buffer that is a mixture with 0.10 *M* acetic acid and 0.10 *M* sodium acetate.
b. Calculate the pH after 1.0 mL of 0.10 *M* NaOH is added to 100 mL of this buffer, giving a solution with a volume of 101 mL.

Solution

a. Calculate the pH of an acetate buffer that is a mixture with 0.10 *M* acetic acid and 0.10 *M* sodium acetate.

To determine the pH of the buffer solution we use a typical equilibrium calculation (as illustrated in earlier Examples):

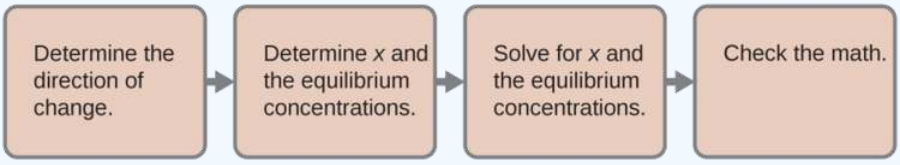

1. *Determine the direction of change.* The equilibrium in a mixture of H_3O^+, $\mathbf{CH_3CO_2^-}$, and CH_3CO_2H is:

$$\mathbf{CH_3CO_2H}(aq) + \mathbf{H_2O}(l) \rightleftharpoons \mathbf{H_3O^+}(aq) + \mathbf{CH_3CO_2^-}(aq)$$

The equilibrium constant for CH_3CO_2H is not given, so we look it up in Table E1: $K_a = 1.8 \times 10^{-5}$. With $[CH_3CO_2H] = [CH_3CO_2^-] = 0.10\ M$ and $[H_3O^+] = \sim 0\ M$, the reaction shifts to the right to form H_3O^+.

2. *Determine* x *and equilibrium concentrations*. A table of changes and concentrations follows:

	$[CH_3CO_2H] + [H_2O] \rightleftharpoons H_3O^+ + [CH_3CO_2^-]$		
Initial concentration (*M*)	0.10	~0	0.10
Change (*M*)	$-x$	x	x
Equilibrium constant (*M*)	$0.10 - x$	x	$0.10 + x$

- *Solve for x and the equilibrium concentrations.* We find:

$$x = 1.8 \times 10^{-5}\ M$$

- and

$$[H_3O^+] = 0 + x = 1.8 \times 10^{-5}\ M$$

Thus:

$$pH = -\log[H_3O^+] = -\log(1.8 \times 10^{-5})$$

$$= 4.74$$

4. *Check the work*. If we calculate all calculated equilibrium concentrations, we find that the equilibrium value of the reaction coefficient, $Q = K_a$.

(b) Calculate the pH after 1.0 mL of 0.10 *M* NaOH is added to 100 mL of this buffer, giving a solution with a volume of 101 mL.

First, we calculate the concentrations of an intermediate mixture resulting from the complete reaction between the acid in the buffer and the added base. Then we determine the concentrations of the mixture at the new equilibrium:

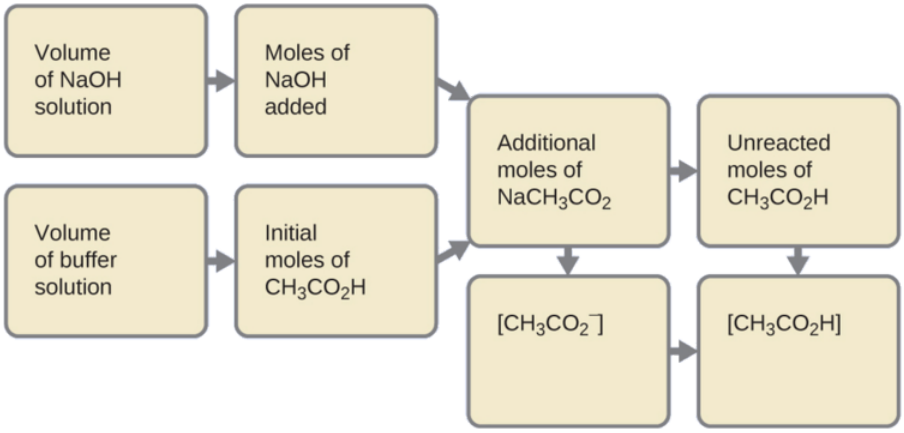

1. *Determine the moles of NaOH*. One milliliter (0.0010 L) of 0.10 *M* NaOH contains:

$$0.0010\,\cancel{L} \times \left(\frac{0.10\ \text{mol NaOH}}{1\,\cancel{L}}\right) = 1.0 \times 10^{-4}\ \text{mol NaOH}$$

2. *Determine the moles of CH_2CO_2H*. Before reaction, 0.100 L of the buffer solution contains:

$$0.100\,\cancel{L} \times \left(\frac{0.100\ \text{mol } CH_3CO_2H}{1\,\cancel{L}}\right) = 1.00 \times 10^{-2}\ \text{mol } CH_3CO_2H$$

3. *Solve for the amount of $NaCH_3CO_2$ produced.* The 1.0×10^{-4} mol of NaOH neutralizes 1.0×10^{-4} mol of CH_3CO_2H, leaving:

$$(1.0 \times 10^{-2}) - (0.01 \times 10^{-2}) = 0.99 \times 10^{-2} \text{ mol } CH_3CO_2H$$

and producing 1.0×10^{-4} mol of $NaCH_3CO_2$. This makes a total of:

[\mathrm{(1.0×10^{−2})+(0.01×10^{−2})=1.01×10^{−2}\:mol\:NaCH_3CO_2} \nonumber \]

4. *Find the molarity of the products.* After reaction, CH_3CO_2H and $NaCH_3CO_2$ are contained in 101 mL of the intermediate solution, so:

$$[CH_3CO_2H] = \frac{9.9 \times 10^{-3} \text{ mol}}{0.101 \text{ L}} = 0.098\ M$$

$$[NaCH_3CO_2] = \frac{1.01 \times 10^{-2} \text{ mol}}{0.101 \text{ L}} = 0.100\ M$$

Now we calculate the pH after the intermediate solution, which is 0.098 *M* in CH_3CO_2H and 0.100 *M* in $NaCH_3CO_2$, comes to equilibrium. The calculation is very similar to that in part (a) of this example:

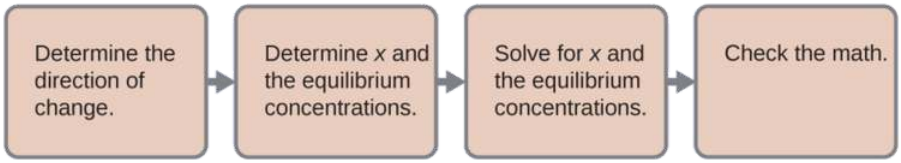

This series of calculations gives a pH = 4.75. Thus the addition of the base barely changes the pH of the solution.

(c) For comparison, calculate the pH after 1.0 mL of 0.10 *M* NaOH is added to 100 mL of a solution of an unbuffered solution with a pH of 4.74 (a 1.8×10^{-5}-*M* solution of HCl). The volume of the final solution is 101 mL.

Solution

This 1.8×10^{-5}-*M* solution of HCl has the same hydronium ion concentration as the 0.10-*M* solution of acetic acid-sodium acetate buffer described in part (a) of this example. The solution contains:

$$0.100 \text{ L} \times \left(\frac{1.8 \times 10^{-5} \text{ mol HCl}}{1 \text{ L}} \right) = 1.8 \times 10^{-6} \text{ mol HCl}$$

As shown in part (b), 1 mL of 0.10 *M* NaOH contains 1.0×10^{-4} mol of NaOH. When the NaOH and HCl solutions are mixed, the HCl is the limiting reagent in the reaction. All of the HCl reacts, and the amount of NaOH that remains is:

$$(1.0 \times 10^{-4}) - (1.8 \times 10^{-6}) = 9.8 \times 10^{-5}\ M$$

The concentration of NaOH is:

$$\frac{9.8 \times 10^{-5}\ M \text{ NaOH}}{0.101 \text{ L}} = 9.7 \times 10^{-4}\ M$$

The pOH of this solution is:

$$\text{pOH} = -\log[OH^-] = -\log(9.7 \times 10^{-4}) = 3.01$$

The pH is:

$$\text{pH} = 14.00 - \text{pOH} = 10.99$$

The pH changes from 4.74 to 10.99 in this unbuffered solution. This compares to the change of 4.74 to 4.75 that occurred when the same amount of NaOH was added to the buffered solution described in part (b).

? Exercise 13.6.1

Show that adding 1.0 mL of 0.10 *M* HCl changes the pH of 100 mL of a 1.8×10^{-5} *M* HCl solution from 4.74 to 3.00.

Answer

Initial pH of 1.8×10^{-5} *M* HCl; pH = $-\log[H_3O^+] = -\log[1.8 \times 10^{-5}] = 4.74$

Moles of H_3O^+ added by addition of 1.0 mL of 0.10 *M* HCl: 0.10 moles/L × 0.0010 L = 1.0×10^{-4} moles; final pH after addition of 1.0 mL of 0.10 *M* HCl:

$$\text{pH} = -\log[\text{H}_3\text{O}^+] = -\log\left(\frac{\text{total moles H}_3\text{O}^+}{\text{total volume}}\right) = -\log\left(\frac{1.0 \times 10^{-4}\ \text{mol} + 1.8 \times 10^{-6}\ \text{mol}}{101\ \text{mL}\left(\frac{1\ \text{L}}{1000\ \text{mL}}\right)}\right) = 3.00$$

Buffer Capacity

Buffer solutions do not have an unlimited capacity to keep the pH relatively constant (Figure **13.6.3**). If we add so much base to a buffer that the weak acid is exhausted, no more buffering action toward the base is possible. On the other hand, if we add an excess of acid, the weak base would be exhausted, and no more buffering action toward any additional acid would be possible. In fact, we do not even need to exhaust all of the acid or base in a buffer to overwhelm it; its buffering action will diminish rapidly as a given component nears depletion.

Figure **13.6.3**: The indicator color (methyl orange) shows that a small amount of acid added to a buffered solution of pH 8 (beaker on the left) has little affect on the buffered system (middle beaker). However, a large amount of acid exhausts the buffering capacity of the solution and the pH changes dramatically (beaker on the right). (credit: modification of work by Mark Ott)

The buffer capacity is the amount of acid or base that can be added to a given volume of a buffer solution before the pH changes significantly, usually by one unit. Buffer capacity depends on the amounts of the weak acid and its conjugate base that are in a buffer mixture. For example, 1 L of a solution that is 1.0 *M* in acetic acid and 1.0 *M* in sodium acetate has a greater buffer capacity than 1 L of a solution that is 0.10 *M* in acetic acid and 0.10 *M* in sodium acetate even though both solutions have the same pH. The first solution has more buffer capacity because it contains more acetic acid and acetate ion.

Selection of Suitable Buffer Mixtures

There are two useful rules of thumb for selecting buffer mixtures:

1. A good buffer mixture should have about equal concentrations of both of its components. A buffer solution has generally lost its usefulness when one component of the buffer pair is less than about 10% of the other. Figure **13.6.4** shows an acetic acid-acetate ion buffer as base is added. The initial pH is 4.74. A change of 1 pH unit occurs when the acetic acid concentration is reduced to 11% of the acetate ion concentration.

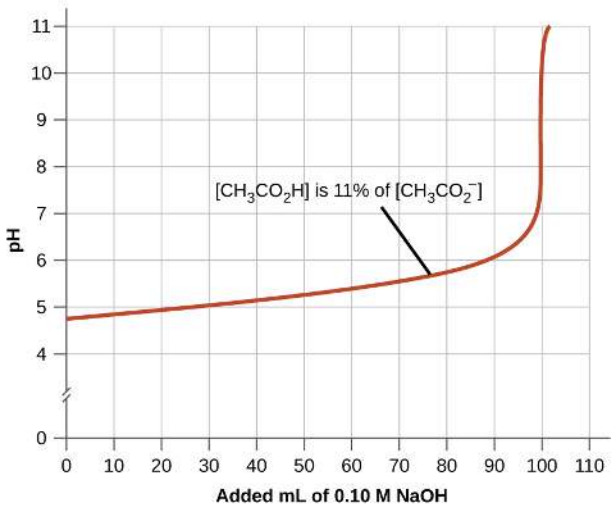

Figure **13.6.4**: The graph, an illustration of buffering action, shows change of pH as an increasing amount of a 0.10-M NaOH solution is added to 100 mL of a buffer solution in which, initially, $[CH_3CO_2H] = 0.10\ M$ and $[CH_3CO_2^-] = 0.10\ M$.

2. Weak acids and their salts are better as buffers for pHs less than 7; weak bases and their salts are better as buffers for pHs greater than 7.

Blood is an important example of a buffered solution, with the principal acid and ion responsible for the buffering action being carbonic acid, H_2CO_3, and the bicarbonate ion, HCO_3^-. When an excess of hydrogen ion enters the blood stream, it is removed primarily by the reaction:

$$H_3O^+(aq) + HCO_3^-(aq) \longrightarrow H_2CO_3(aq) + H_2O(l)$$

When an excess of the hydroxide ion is present, it is removed by the reaction:

$$OH^-(aq) + H_2CO_3(aq) \longrightarrow HCO_3^-(aq) + H_2O(l)$$

The pH of human blood thus remains very near 7.35, that is, slightly basic. Variations are usually less than 0.1 of a pH unit. A change of 0.4 of a pH unit is likely to be fatal.

The Henderson-Hasselbalch Approximation

The ionization-constant expression for a solution of a weak acid can be written as:

$$K_a = \frac{[H3O+][A-]}{[HA]}$$

Rearranging to solve for $[H_3O^+]$, we get:

$$[H_3O^+] = K_a \times \frac{[HA]}{[A-]}$$

Taking the negative logarithm of both sides of this equation, we arrive at:

$$-\log[H_3O^+] = -\log K_a - \log\frac{[HA]}{[A^-]}$$

which can be written as

$$pH = pK_a + \log\frac{[A^-]}{[HA]}$$

where pK_a is the negative of the common logarithm of the ionization constant of the weak acid ($pK_a = -\log K_a$). This equation relates the pH, the ionization constant of a weak acid, and the concentrations of the weak acid and its salt in a buffered solution. Scientists often use this expression, called the Henderson-Hasselbalch approximation, to calculate the pH of buffer solutions. It is important to note that the "x is small" assumption must be valid to use this equation.

Lawrence Joseph Henderson and Karl Albert Hasselbalch

Lawrence Joseph Henderson (1878–1942) was an American physician, biochemist and physiologist, to name only a few of his many pursuits. He obtained a medical degree from Harvard and then spent 2 years studying in Strasbourg, then a part of Germany, before returning to take a lecturer position at Harvard. He eventually became a professor at Harvard and worked there his entire life. He discovered that the acid-base balance in human blood is regulated by a buffer system formed by the dissolved carbon dioxide in blood. He wrote an equation in 1908 to describe the carbonic acid-carbonate buffer system in blood. Henderson was broadly knowledgeable; in addition to his important research on the physiology of blood, he also wrote on the adaptations of organisms and their fit with their environments, on sociology and on university education. He also founded the Fatigue Laboratory, at the Harvard Business School, which examined human physiology with specific focus on work in industry, exercise, and nutrition.

In 1916, Karl Albert Hasselbalch (1874–1962), a Danish physician and chemist, shared authorship in a paper with Christian Bohr in 1904 that described the Bohr effect, which showed that the ability of hemoglobin in the blood to bind with oxygen was inversely related to the acidity of the blood and the concentration of carbon dioxide. The pH scale was introduced in 1909 by another Dane, Sørensen, and in 1912, Hasselbalch published measurements of the pH of blood. In 1916, Hasselbalch expressed Henderson's equation in logarithmic terms, consistent with the logarithmic scale of pH, and thus the Henderson-Hasselbalch equation was born.

Medicine: The Buffer System in Blood

The normal pH of human blood is about 7.4. The carbonate buffer system in the blood uses the following equilibrium reaction:

$$\mathrm{CO_2}(g) + 2\,\mathrm{H_2O}(l) \rightleftharpoons \mathrm{H_2CO_3}(aq) \rightleftharpoons \mathrm{HCO_3^-}(aq) + \mathrm{H_3O^+}(aq)$$

The concentration of carbonic acid, H_2CO_3 is approximately 0.0012 *M*, and the concentration of the hydrogen carbonate ion, $\mathbf{HCO_3^-}$, is around 0.024 *M*. Using the Henderson-Hasselbalch equation and the pK_a of carbonic acid at body temperature, we can calculate the pH of blood:

$$\mathrm{pH} = \mathrm{p}K_a + \log\frac{[\text{base}]}{[\text{acid}]} = 6.1 + \log\frac{0.024}{0.0012} = 7.4$$

The fact that the H_2CO_3 concentration is significantly lower than that of the $\mathbf{HCO_3^-}$ ion may seem unusual, but this imbalance is due to the fact that most of the by-products of our metabolism that enter our bloodstream are acidic. Therefore, there must be a larger proportion of base than acid, so that the capacity of the buffer will not be exceeded.

Lactic acid is produced in our muscles when we exercise. As the lactic acid enters the bloodstream, it is neutralized by the $\mathbf{HCO_3^-}$ ion, producing H_2CO_3. An enzyme then accelerates the breakdown of the excess carbonic acid to carbon dioxide and water, which can be eliminated by breathing. In fact, in addition to the regulating effects of the carbonate buffering system on the pH of blood, the body uses breathing to regulate blood pH. If the pH of the blood decreases too far, an increase in breathing removes CO_2 from the blood through the lungs driving the equilibrium reaction such that $[H_3O^+]$ is lowered. If the blood is too alkaline, a lower breath rate increases CO_2 concentration in the blood, driving the equilibrium reaction the other way, increasing $[H^+]$ and restoring an appropriate pH.

Summary

A solution containing a mixture of an acid and its conjugate base, or of a base and its conjugate acid, is called a buffer solution. Unlike in the case of an acid, base, or salt solution, the hydronium ion concentration of a buffer solution does not change greatly when a small amount of acid or base is added to the buffer solution. The base (or acid) in the buffer reacts with the added acid (or base).

Key Equations

- $pK_a = -\log K_a$
- $pK_b = -\log K_b$
- $\mathbf{pH = pK_a + \log \frac{[A^-]}{[HA]}}$

Glossary

buffer capacity

amount of an acid or base that can be added to a volume of a buffer solution before its pH changes significantly (usually by one pH unit)

buffer

mixture of a weak acid or a weak base and the salt of its conjugate; the pH of a buffer resists change when small amounts of acid or base are added

Henderson-Hasselbalch equation

equation used to calculate the pH of buffer solutions

This page titled 13.6: Buffers is shared under a CC BY license and was authored, remixed, and/or curated by OpenStax.

- **14.6: Buffers** by OpenStax is licensed CC BY 4.0. Original source: https://openstax.org/details/books/chemistry-2e.

13.7: Acid-Base Titrations

Learning Objectives

- Interpret titration curves for strong and weak acid-base systems
- Compute sample pH at important stages of a titration
- Explain the function of acid-base indicators

As seen in the chapter on the stoichiometry of chemical reactions, titrations can be used to quantitatively analyze solutions for their acid or base concentrations. In this section, we will explore the changes in the concentrations of the acidic and basic species present in a solution during the process of a titration.

Titration Curves

Previously, when we studied acid-base reactions in solution, we focused only on the point at which the acid and base were stoichiometrically equivalent. No consideration was given to the pH of the solution before, during, or after the neutralization.

Example 13.7.1: Calculating pH for Titration Solutions: Strong Acid/Strong Base

A titration is carried out for 25.00 mL of 0.100 *M* HCl (strong acid) with 0.100 *M* of a strong base NaOH the titration curve is shown in Figure **13.7.1**. Calculate the pH at these volumes of added base solution:

a. 0.00 mL
b. 12.50 mL
c. 25.00 mL
d. 37.50 mL

Solution

Since HCl is a strong acid, we can assume that all of it dissociates. The initial concentration of H_3O^+ is $[\mathbf{H_3O^+}]_0 = 0.100\ M$. When the base solution is added, it also dissociates completely, providing OH^- ions. The H_3O^+ and OH^- ions neutralize each other, so only those of the two that were in excess remain, and their concentration determines the pH. Thus, the solution is initially acidic (pH < 7), but eventually all the hydronium ions present from the original acid are neutralized, and the solution becomes neutral. As more base is added, the solution turns basic.

The total initial amount of the hydronium ions is:

$$\mathbf{n(H^+)_0 = [H_3O^+]_0 \times 0.02500\ L = 0.002500\ mol}$$

Once X mL of the 0.100-*M* base solution is added, the number of moles of the OH^- ions introduced is:

$$\mathbf{n(OH^-)_0} = 0.100\ M \times \mathbf{X\ mL} \times \left(\frac{\mathbf{1\ L}}{\mathbf{1000\ mL}}\right)$$

The total volume becomes:

$$V = (\mathbf{25.00\ mL + X\ mL})\left(\frac{\mathbf{1\ L}}{\mathbf{1000\ mL}}\right)$$

The number of moles of H_3O^+ becomes:

$$\mathbf{n(H^+) = n(H^+)_0 - n(OH^-)_0 = 0.002500\ mol} - 0.100\ M \times \mathbf{X\ mL} \times \left(\frac{\mathbf{1\ L}}{\mathbf{1000\ mL}}\right)$$

The concentration of H_3O^+ is:

$$[\mathbf{H_3O^+}] = \frac{\mathbf{n(H^+)}}{\mathbf{V}} = \frac{\mathbf{0.002500\ mol} - 0.100\ M \times \mathbf{X\ mL} \times \left(\frac{\mathbf{1\ L}}{\mathbf{1000\ mL}}\right)}{(\mathbf{25.00\ mL + X\ mL})\left(\frac{\mathbf{1\ L}}{\mathbf{1000\ mL}}\right)}$$

$$= \frac{0.002500\ \text{mol} \times \left(\frac{1000\ \text{mL}}{1\ \text{L}}\right) - 0.100\ M \times \text{X mL}}{25.00\ \text{mL} + \text{X mL}}$$

with the definition of $\mathbf{pH}$:

$$\mathbf{pH} = -\log([\mathbf{H_3O^+}]) \tag{13.7.1}$$

The preceding calculations work if $\mathbf{n(H^+)_0 - n(OH^-)_0 > 0}$ and so n(H^+) > 0. When $\mathbf{n(H^+)_0 = n(OH^-)_0}$, the H_3O^+ ions from the acid and the OH^- ions from the base mutually neutralize. At this point, the only hydronium ions left are those from the autoionization of water, and there are no OH^- particles to neutralize them. Therefore, in this case:

$$[H_3O^+] = [OH^-\ ],\ [H_3O^+] = K_w = 1.0 \times 10^{-14};\ [H_3O^+] = 1.0 \times 10^{-7}$$

$$\text{pH} = -\log(1.0 \times 10^{-7}) = 7.00$$

Finally, when $\mathbf{n(OH^-)_0 > n(H^+)_0}$, there are not enough H_3O^+ ions to neutralize all the OH^- ions, and instead of $\mathbf{n(H^+) = n(H^+)_0 - n(OH^-)_0}$, we calculate: $\mathbf{n(OH^-) = n(OH^-)_0 - n(H^+)_0}$

In this case:

$$[OH^-] = \frac{\text{n}(OH^-)}{V} = \frac{0.100\ M \times \text{X mL} \times \left(\frac{1\ \text{L}}{1000\ \text{mL}}\right) - 0.002500\ \text{mol}}{(25.00\ \text{mL} + \text{X mL})\left(\frac{1\ \text{L}}{1000\ \text{mL}}\right)}$$

$$= \frac{0.100\ M \times \text{X mL} - 0.002500\ \text{mol} \times \left(\frac{1000\ \text{mL}}{1\ \text{L}}\right)}{25.00\ \text{mL} + \text{X mL}}$$

then using the definition of pOH and its relationship to pH in room temperature aqueous solutios (Equation 13.7.1):

$$\begin{aligned} pH &= 14 - pOH \\ &= 14 + \log([OH^-]) \end{aligned}$$

Let us now consider the four specific cases presented in this problem:

(a) X = 0 mL

$$[H_3O^+] = \frac{\text{n}(H^+)}{V} = \frac{0.002500\ \text{mol} \times \left(\frac{1000\ \text{mL}}{1\ \text{L}}\right)}{25.00\ \text{mL}} = 0.1\ M$$

then using the definition of pH (Equation 13.7.1):

$$\begin{aligned} pH &= -\log(0.100) \\ &= 1.000 \end{aligned}$$

(b) X = 12.50 mL

$$[H_3O^+] = \frac{\text{n}(H^+)}{V} = \frac{0.002500\ \text{mol} \times \left(\frac{1000\ \text{mL}}{1\ \text{L}}\right) - 0.100\ M \times 12.50\ \text{mL}}{25.00\ \text{mL} + 12.50\ \text{mL}} = 0.0333\ M$$

then using the definition of pH (Equation 13.7.1):

$$\begin{aligned} pH &= -\log(0.0333) \\ &= 1.477 \end{aligned}$$

(c) X = 25.00 mL

Since the volumes and concentrations of the acid and base solutions are the same:

$$\mathbf{n(H^+)_0 = n(OH^-)_0}$$

and

$$pH = 7.000$$

as described earlier.

(d) X = 37.50 mL

In this case:

$$\mathrm{n(OH^-)_0 > n(H^+)_0}$$

$$[\mathrm{OH^-}] = \frac{\mathrm{n(OH^-)}}{V} = \frac{0.100\ M \times 35.70\ \mathrm{mL} - 0.002500\ \mathrm{mol} \times \left(\frac{1000\ \mathrm{mL}}{1\ \mathrm{L}}\right)}{25.00\ \mathrm{mL} + 37.50\ \mathrm{mL}} = 0.0200\ M$$

then using the definition of pH (Equation 13.7.1):

$$\begin{aligned} [pH &= 14 - pOH \\ &= 14 + \log([OH^-]) \\ &= 14 + \log(0.0200) \\ &= 12.30 \end{aligned}$$

Exercise 13.7.1

Calculate the pH for the strong acid/strong base titration between 50.0 mL of 0.100 *M* $HNO_3(aq)$ and 0.200 *M* NaOH (titrant) at the listed volumes of added base:

a. 0.00 mL,
b. 15.0 mL,
c. 25.0 mL, and
d. 40.0 mL.

Answer a

0.00: 1.000

Answer b

15.0: 1.5111

Answer c

25.0: 7e. Do not delete this text first.

Answer d

40.0: 12.523

In Example **13.7.1**, we calculated pH at four points during a titration. Table **13.7.1** shows a detailed sequence of changes in the pH of a strong acid and a weak acid in a titration with NaOH.

Table **13.7.1**: pH Values in the Titrations of a Strong Acid with a Strong Base and of a Weak Acid with a Strong Base

Volume of 0.100 M NaOH Added (mL)	Moles of NaOH Added	pH Values 0.100 M HCl[1]	pH Values 0.100 M CH_3CO_2H[2]
0.0	0.0	1.00	2.87
5.0	0.00050	1.18	4.14
10.0	0.00100	1.37	4.57
15.0	0.00150	1.60	4.92
20.0	0.00200	1.95	5.35
22.0	0.00220	2.20	5.61
24.0	0.00240	2.69	6.13
24.5	0.00245	3.00	6.44
24.9	0.00249	3.70	7.14
25.0	0.00250	7.00	8.72
25.1	0.00251	10.30	10.30
25.5	0.00255	11.00	11.00
26.0	0.00260	11.29	11.29
28.0	0.00280	11.75	11.75
30.0	0.00300	11.96	11.96
35.0	0.00350	12.22	12.22
40.0	0.00400	12.36	12.36
45.0	0.00450	12.46	12.46
50.0	0.00500	12.52	12.52

1. Titration of 25.00 mL of 0.100 *M* HCl (0.00250 mol of HCI) with 0.100 *M* NaOH.
2. Titration of 25.00 mL of 0.100 *M* CH_3CO_2H (0.00250 mol of CH_3CO_2H) with 0.100 *M* NaOH.

The simplest acid-base reactions are those of a strong acid with a strong base. Table **13.7.1** shows data for the titration of a 25.0-mL sample of 0.100 *M* hydrochloric acid with 0.100 *M* sodium hydroxide. The values of the pH measured after successive additions of small amounts of NaOH are listed in the first column of this table, and are graphed in Figure **13.7.1**, in a form that is called a titration curve. The pH increases slowly at first, increases rapidly in the middle portion of the curve, and then increases slowly again. The point of inflection (located at the midpoint of the vertical part of the curve) is the equivalence point for the titration. It indicates when equivalent quantities of acid and base are present. For the titration of a strong acid with a strong base, the equivalence point occurs at a pH of 7.00 and the points on the titration curve can be calculated using solution stoichiometry (Table **13.7.1** and Figure **13.7.1**).

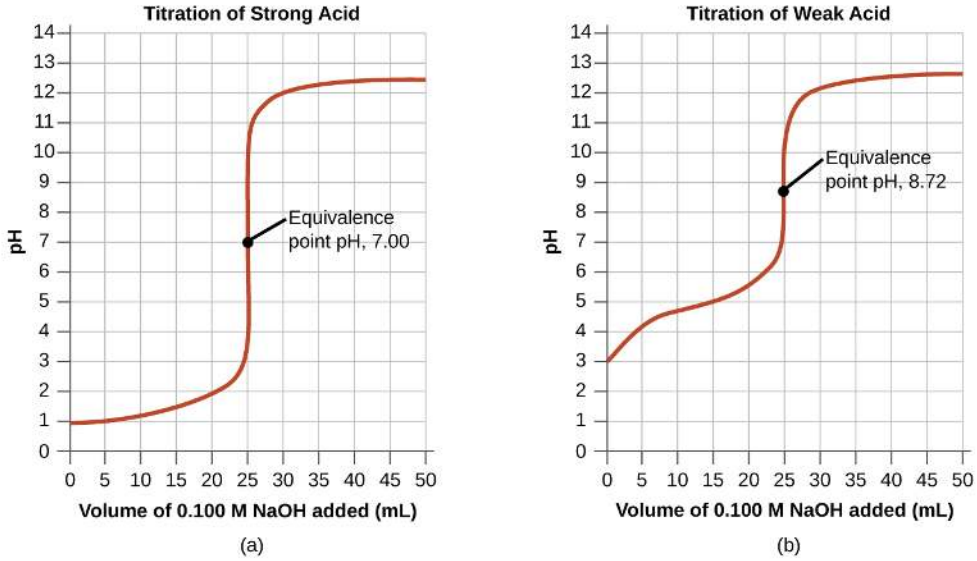

Figure **13.7.1**: (a) The titration curve for the titration of 25.00 mL of 0.100 M HCl (strong acid) with 0.100 M NaOH (strong base) has an equivalence point of 7.00 pH. (b) The titration curve for the titration of 25.00 mL of 0.100 M CH_3CO_2H (weak acid) with 0.100 M NaOH (strong base) has an equivalence point of 8.72 pH.

Two graphs are shown. The first graph on the left is titled “Titration of Weak Acid.” The horizontal axis is labeled “Volume of 0.100 M N a O H added (m L).” Markings and vertical gridlines are provided every 5 units from 0 to 50. The vertical axis is labeled “p H” and is marked every 1 unis beginning at 0 extending to 14. A red curve is drawn on the graph which increases steadily from the point (0, 3) up to about (20, 5.5) after which the graph has a vertical section from (25, 7) up to (25, 11). The graph then levels off to a value of about 12.5 from about 40 m L up to 50 m L. The midpoint of the vertical segment of the curve is labeled “Equivalence point p H, 8.72.” The second graph on the right is titled “Titration of Strong Acid.” The horizontal axis is labeled “Volume of 0.100 M N a O H added (m L).” Markings and vertical gridlines are provided every 5 units from 0 to 50. The vertical axis is labeled “p H” and is marked every 1 units beginning at 0 extending to 14. A red curve is drawn on the graph which increases gradually from the point (0, 1) up to about (22.5, 2.2) after which the graph has a vertical section from (25, 4) up to nearly (25, 11). The graph then levels off to a value of about 12.4 from about 40 m L up to 50 m L. The midpoint of the vertical segment of the curve is labeled “Equivalence point p H, 7.00.”

The titration of a weak acid with a strong base (or of a weak base with a strong acid) is somewhat more complicated than that just discussed, but it follows the same general principles. Let us consider the titration of 25.0 mL of 0.100 *M* acetic acid (a weak acid) with 0.100 *M* sodium hydroxide and compare the titration curve with that of the strong acid. Table **13.7.1** gives the pH values during the titration, Figure **13.7.1***b* shows the titration curve.

Although the initial volume and molarity of the acids are the same, there are important differences between the two titration curves. The titration curve for the weak acid begins at a higher value (less acidic) and maintains higher pH values up to the equivalence point. This is because acetic acid is a weak acid, which is only partially ionized. The pH at the equivalence point is also higher (8.72 rather than 7.00) due to the hydrolysis of acetate, a weak base that raises the pH:

$$\mathrm{CH_3CO_2^-}(aq) + \mathrm{H_2O}(l) \rightleftharpoons \mathrm{CH_3CO_2H}(l) + \mathrm{OH^-}(aq)$$

After the equivalence point, the two curves are identical because the pH is dependent on the excess of hydroxide ion in both cases.

Example **13.7.2**: Titration of a Weak Acid with a Strong Base

The titration curve shown in Figure **13.7.1***b* is for the titration of 25.00 mL of 0.100 *M* CH_3CO_2H with 0.100 *M* NaOH. The reaction can be represented as:

$$\mathrm{CH_3CO_2H} + \mathrm{OH^-} \longrightarrow \mathrm{CH_3CO_2^-} + \mathrm{H_2O}$$

a. What is the initial pH before any amount of the NaOH solution has been added? $K_a = 1.8 \times 10^{-5}$ for CH_3CO_2H.
b. Find the pH after 25.00 mL of the NaOH solution have been added.
c. Find the pH after 12.50 mL of the NaOH solution has been added.
d. Find the pH after 37.50 mL of the NaOH solution has been added.

Solution

(a) Assuming that the dissociated amount is small compared to 0.100 *M*, we find that:

$$K_a = \frac{[H3O+][CH3CO2-]}{[CH3CO2H]} \approx \frac{[H3O+]^2}{[CH3CO2H]_0}$$

and

$$[H_3O^+] = \sqrt{K_a \times [CH_3CO_2H]} = \sqrt{1.8 \times 10^{-5} \times 0.100} = 1.3 \times 10^{-3}$$

$$pH = -\log(1.3 \times 10^{-3}) = 2.87$$

(b) After 25.00 mL of NaOH are added, the number of moles of NaOH and CH_3CO_2H are equal because the amounts of the solutions and their concentrations are the same. All of the CH_3CO_2H has been converted to $CH_3CO_2^-$. The concentration of the $CH_3CO_2^-$ ion is:

$$\frac{0.00250\ \text{mol}}{0.0500\ \text{L}} = 0.0500\ {}_{32}\text{MCHCO}^-$$

The equilibrium that must be focused on now is the basicity equilibrium for $CH_3CO_2^-$:

$$CH_3CO_2^-(aq) + H_2O(l) \rightleftharpoons CH_3CO_2H(aq) + OH^-(aq)$$

so we must determine K_b for the base by using the ion product constant for water:

$$K_b = \frac{[CH3CO2H][OH-]}{[CH3CO2-]}$$

$$K_a = \frac{[CH3CO2-][H+]}{[CH3CO2H]}, \text{ so } \frac{[CH3CO2H]}{[CH3CO2-]} = \frac{[H^+]}{K_a}.$$

Since $K_w = [H^+][OH^-]$:

$$K_b = \frac{[H^+][OH^-]}{K_a} \tag{13.7.2}$$

$$= \frac{K_w}{K_a} \tag{13.7.3}$$

$$= \frac{1.0 \times 10^{-14}}{1.8 \times 10^{-5}} \tag{13.7.4}$$

$$= 5.6 \times 10^{-10} \tag{13.7.5}$$

Let us denote the concentration of each of the products of this reaction, CH_3CO_2H and OH^-, as *x*. Using the assumption that *x* is small compared to 0.0500 *M*, $K_b = \frac{x^2}{0.0500\ M}$, and then:

$$x = [OH^-] = 5.3 \times 10^{-6}$$

$$pOH = -\log(5.3 \times 10^{-6}) = 5.28$$

$$pH = 14.00 - 5.28 = 8.72$$

Note that the pH at the equivalence point of this titration is significantly greater than 7.

(c) In (a), 25.00 mL of the NaOH solution was added, and so practically all the CH_3CO_2H was converted into $CH_3CO_2^-$. In this case, only 12.50 mL of the base solution has been introduced, and so only half of all the CH_3CO_2H is converted into $CH_3CO_2^-$. The total initial number of moles of CH_3CO_2H is 0.02500L × 0.100 $\underline{M}$ = 0.00250 mol, and so after adding the NaOH, the numbers of moles of CH_3CO_2H and $CH_3CO_2^-$ are both approximately equal to $\frac{0.00250\ \text{mol}}{2} = 0.00125\ \text{mol}$, and their concentrations are the same.

Since the amount of the added base is smaller than the original amount of the acid, the equivalence point has not been reached, the solution remains a buffer, and we can use the Henderson-Hasselbalch equation:

$$\mathrm{pH} = \mathrm{p}K_a + \log\frac{[Base]}{[Acid]} = -\log(K_a) + \log\frac{[CH3CO2-]}{[CH3CO2H]} = -\log(1.8\times10^{-5}) + \log(1)$$

(as the concentrations of $\mathbf{CH_3CO_2^-}$ and CH_3CO_2H are the same)

Thus:

$$\mathrm{pH} = -\log(1.8\times10^{-5}) = 4.74$$

(the pH = the pK_a at the halfway point in a titration of a weak acid)

(d) After 37.50 mL of NaOH is added, the amount of NaOH is 0.03750 L × 0.100 *M* = 0.003750 mol NaOH. Since this is past the equivalence point, the excess hydroxide ions will make the solution basic, and we can again use stoichiometric calculations to determine the pH:

$$[\mathrm{OH^-}] = \frac{(0.003750\ \mathrm{mol} - 0.00250\ \mathrm{mol})}{0.06250\ \mathrm{L}} = 2.00\times10^{-2}\ M$$

So:

$$\mathrm{pOH} = -\log(2.00\times10^{-2}) = 1.70,\ \text{and}\ \mathrm{pH} = 14.00 - 1.70 = 12.30$$

Note that this result is the same as for the strong acid-strong base titration example provided, since the amount of the strong base added moves the solution past the equivalence point.

? Exercise 13.7.2

Calculate the pH for the weak acid/strong base titration between 50.0 mL of 0.100 *M* HCOOH(*aq*) (formic acid) and 0.200 *M* NaOH (titrant) at the listed volumes of added base:

a. 0.00 mL,
b. 15.0 mL,
c. 25.0 mL, and
d. 30.0 mL.

Answer a

0.00 mL: 2.37

Answer b

15.0 mL: 3.92

Answer c

25.00 mL: 8.29

Answer d

30.0 mL: 12.097

Acid-Base Indicators

Certain organic substances change color in dilute solution when the hydronium ion concentration reaches a particular value. For example, phenolphthalein is a colorless substance in any aqueous solution with a hydronium ion concentration greater than 5.0×10^{-9} *M* (pH < 8.3). In more basic solutions where the hydronium ion concentration is less than 5.0×10^{-9} *M* (pH > 8.3), it is red or pink. Substances such as phenolphthalein, which can be used to determine the pH of a solution, are called acid-base indicators. Acid-base indicators are either weak organic acids or weak organic bases.

The equilibrium in a solution of the acid-base indicator methyl orange, a weak acid, can be represented by an equation in which we use **HIn** as a simple representation for the complex methyl orange molecule:

$$\underbrace{\mathrm{HIn\,(aq)}}_{\text{red}} + \mathrm{H_2O\,(l)} \rightleftharpoons \mathrm{H_3O^+\,(aq)} + \underbrace{\mathrm{In^-\,(aq)}}_{\text{yellow}}$$

$$K_a = \frac{[H3O+][In-]}{[HIn]} = 4.0 \times 10^{-4}$$

The anion of methyl orange, $\mathbf{In^-}$, is yellow, and the nonionized form, **HIn**, is red. When we add acid to a solution of methyl orange, the increased hydronium ion concentration shifts the equilibrium toward the nonionized red form, in accordance with Le Chatelier's principle. If we add base, we shift the equilibrium towards the yellow form. This behavior is completely analogous to the action of buffers.

An indicator's color is the visible result of the ratio of the concentrations of the two species In^- and **HIn**. If most of the indicator (typically about 60−90% or more) is present as $\mathbf{In^-}$, then we see the color of the $\mathbf{In^-}$ ion, which would be yellow for methyl orange. If most is present as **HIn**, then we see the color of the **HIn** molecule: red for methyl orange. For methyl orange, we can rearrange the equation for K_a and write:

$$\frac{[\mathrm{In^-}]}{[\mathrm{HIn}]} = \frac{[\text{substance with yellow color}]}{[\text{substance with red color}]} = \frac{K_a}{[\mathrm{H_3O^+}]} \tag{13.7.6}$$

Equation 13.7.6 shows us how the ratio of $\frac{[In-]}{[HIn]}$ varies with the concentration of hydronium ion. The above expression describing the indicator equilibrium can be rearranged:

$$\frac{[H_3O^+]}{K_a} = \frac{[HIn]}{[In^-]} \tag{13.7.7}$$

$$\log\left(\frac{[H_3O^+]}{K_a}\right) = \log\left(\frac{[HIn]}{[In^-]}\right) \tag{13.7.8}$$

$$\log([H_3O^+]) - \log(K_a) = -\log\left(\frac{[In^-]}{[HIn]}\right) \tag{13.7.9}$$

$$-pH + pK_a = -\log\left(\frac{[In^-]}{[HIn]}\right) \tag{13.7.10}$$

$$pH = pK_a + \log\left(\frac{[In^-]}{[HIn]}\right) \tag{13.7.11}$$

or in general terms

$$pH = pK_a + \log\left(\frac{[base]}{[acid]}\right) \tag{13.7.12}$$

Equation 13.7.12 is the same as the *Henderson-Hasselbalch equation*, which can be used to describe the equilibrium of indicators.

When $[H_3O^+]$ has the same numerical value as K_a, the ratio of $[In^-]$ to [HIn] is equal to 1, meaning that 50% of the indicator is present in the red form (HIn) and 50% is in the yellow ionic form (In^-), and the solution appears orange in color. When the hydronium ion concentration increases to 8×10^{-4} *M* (a pH of 3.1), the solution turns red. No change in color is visible for any further increase in the hydronium ion concentration (decrease in pH). At a hydronium ion concentration of 4×10^{-5} *M* (a pH of 4.4), most of the indicator is in the yellow ionic form, and a further decrease in the hydronium ion concentration (increase in pH) does not produce a visible color change. The pH range between 3.1 (red) and 4.4 (yellow) is the color-change interval of methyl orange; the pronounced color change takes place between these pH values.

There are many different acid-base indicators that cover a wide range of pH values and can be used to determine the approximate pH of an unknown solution by a process of elimination. Universal indicators and pH paper contain a mixture of indicators and exhibit different colors at different pHs. Figure **13.7.2** presents several indicators, their colors, and their color-change intervals.

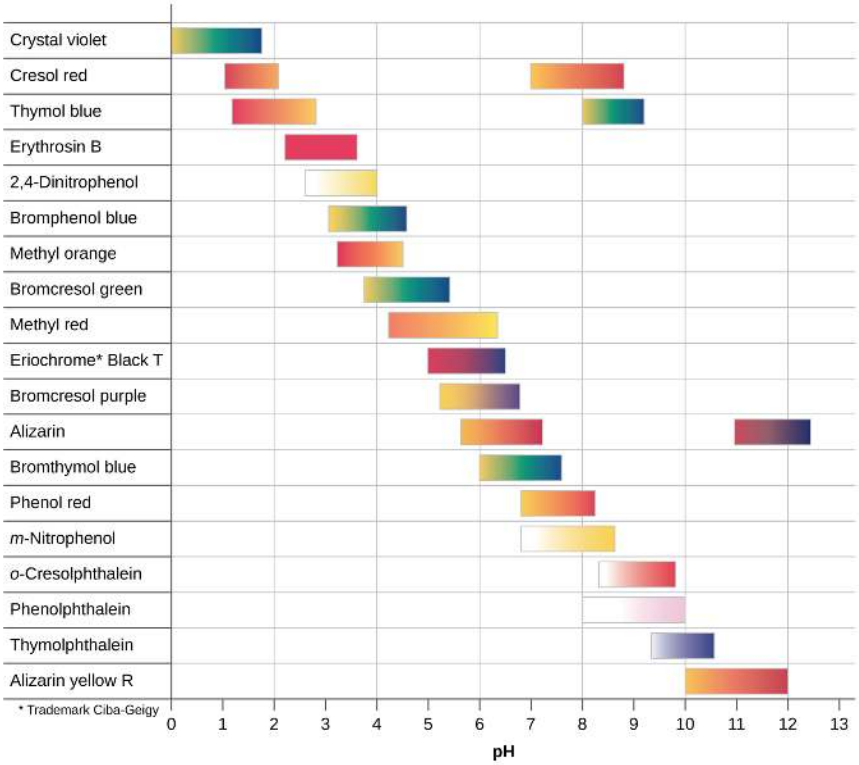

Figure 13.7.2: This chart illustrates the ranges of color change for several acid-base indicators.

Titration curves help us pick an indicator that will provide a sharp color change at the equivalence point. The best selection would be an indicator that has a color change interval that brackets the pH at the equivalence point of the titration.

The color change intervals of three indicators are shown in Figure 13.7.3. The equivalence points of both the titration of the strong acid and of the weak acid are located in the color-change interval of phenolphthalein. We can use it for titrations of either strong acid with strong base or weak acid with strong base.

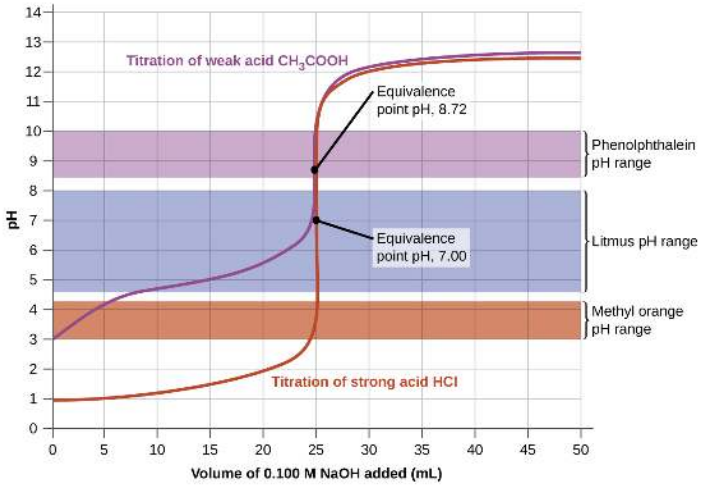

Figure **13.7.3**: The graph shows a titration curve for the titration of 25.00 mL of 0.100 M CH_3CO_2H (weak acid) with 0.100 M NaOH (strong base) and the titration curve for the titration of HCl (strong acid) with NaOH (strong base). The pH ranges for the color change of phenolphthalein, litmus, and methyl orange are indicated by the shaded areas.

A graph is shown which is titled “Titration of Weak Acid.” The horizontal axis is labeled “Volume of 0.100 M N a O H added (m L)” and begins at 0 with markings every 5 units up to 50. The vertical axis is labeled “p H” and begins at 0 and increases by single units up to 14. A red curve is drawn on the graph. The curve begins at (0, 3) and passes through the points (5, 4.1), (10, 4.7), (15, 5), (20, 5.5), and (22.5, 6), after which it rapidly increases, forming a vertical section centered at the point (25, 8.7). The rapid increase of the curve then levels off and the curve passes through the points (30, 12), (35, 12.4), (40, 12.5), (45, 12.6), and (50, 12.6). A brown rectangle extends horizontally across the graph covering the p H of 3 to 4.2 range. To the right, this rectangle is labeled “Methyl orange p H range.” A blue rectangle extends horizontally across the graph covering the p H of 4.6 to 8 range. To the right, this rectangle is labeled “Litmus p H range.” A purple rectangle extends horizontally across the graph covering the p H of 8.4 to 10 range. To the right, this rectangle is labeled “Phenolphthalein p H range.” The midpoint of the vertical segment of the curve is labeled “Equivalence point p H, 8.72.”

Litmus is a suitable indicator for the HCl titration because its color change brackets the equivalence point. However, we should not use litmus for the CH_3CO_2H titration because the pH is within the color-change interval of litmus when only about 12 mL of NaOH has been added, and it does not leave the range until 25 mL has been added. The color change would be very gradual, taking place during the addition of 13 mL of NaOH, making litmus useless as an indicator of the equivalence point.

We could use methyl orange for the HCl titration, but it would not give very accurate results: (1) It completes its color change slightly before the equivalence point is reached (but very close to it, so this is not too serious); (2) it changes color, as Figure **13.7.2** demonstrates, during the addition of nearly 0.5 mL of NaOH, which is not so sharp a color change as that of litmus or phenolphthalein; and (3) it goes from yellow to orange to red, making detection of a precise endpoint much more challenging than the colorless to pink change of phenolphthalein. Figure **13.7.2** shows us that methyl orange would be completely useless as an indicator for the CH_3CO_2H titration. Its color change begins after about 1 mL of NaOH has been added and ends when about 8 mL has been added. The color change is completed long before the equivalence point (which occurs when 25.0 mL of NaOH has been added) is reached and hence provides no indication of the equivalence point.

We base our choice of indicator on a calculated pH, the pH at the equivalence point. At the equivalence point, equimolar amounts of acid and base have been mixed, and the calculation becomes that of the pH of a solution of the salt resulting from the titration.

Summary

A titration curve is a graph that relates the change in pH of an acidic or basic solution to the volume of added titrant. The characteristics of the titration curve are dependent on the specific solutions being titrated. The pH of the solution at the equivalence point may be greater than, equal to, or less than 7.00. The choice of an indicator for a given titration depends on the expected pH at the equivalence point of the titration, and the range of the color change of the indicator.

Glossary

acid-base indicator

organic acid or base whose color changes depending on the pH of the solution it is in

color-change interval

range in pH over which the color change of an indicator takes place

titration curve

plot of the pH of a solution of acid or base versus the volume of base or acid added during a titration

---

This page titled 13.7: Acid-Base Titrations is shared under a CC BY license and was authored, remixed, and/or curated by OpenStax.

- **14.7: Acid-Base Titrations** by OpenStax is licensed CC BY 4.0. Original source: https://openstax.org/details/books/chemistry-2e.

13.8: Acid-Base Equilibria (Exercises)

14.1: Brønsted-Lowry Acids and Bases

Q14.1.1

Write equations that show NH_3 as both a conjugate acid and a conjugate base.

S14.1.1

One example for NH_3 as a conjugate acid: $\mathbf{NH_2^- + H^+ \longrightarrow NH_3}$; as a conjugate base: $\mathbf{NH_4^+(aq) + OH^-(aq) \longrightarrow NH_3(aq) + H_2O(l)}$

Q14.1.2

Write equations that show $\mathbf{H_2PO_4^-}$ acting both as an acid and as a base.

Q14.1.3

Show by suitable net ionic equations that each of the following species can act as a Brønsted-Lowry acid:

a. $\mathbf{H_3O^+}$
b. HCl
c. NH_3
d. CH_3CO_2H
e. $\mathbf{NH_4^+}$
f. $\mathbf{HSO_4^-}$

S14.1.3

a. $\mathbf{H_3O^+(aq) \longrightarrow H^+(aq) + H_2O_{(l)}}$;
b. $\mathbf{HCl(l) \longrightarrow H^+(aq) + Cl^-(aq)}$;
c. $\mathbf{NH_3(aq) \longrightarrow H^+(aq) + NH_2^-(aq)}$;
d. $\mathbf{CH_3CO_2H(aq) \longrightarrow H^+(aq) + CH_3CO_2^-(aq)}$;
e. $\mathbf{NH_4^+(aq) \longrightarrow H^+(aq) + NH_3(aq)}$;
f. $\mathbf{HSO_4^-(aq) \longrightarrow H^+(aq) + SO_4^{2-}(aq)}$

Q14.1.4

Show by suitable net ionic equations that each of the following species can act as a Brønsted-Lowry acid:

a. HNO_3
b. $\mathbf{PH_4^+}$
c. H_2S
d. CH_3CH_2COOH
e. $\mathbf{H_2PO_4^-}$
f. HS^-

Q14.1.5

Show by suitable net ionic equations that each of the following species can act as a Brønsted-Lowry base:

a. H_2O
b. $\mathbf{OH^-}$
c. NH_3
d. CN^-
e. S^{2-}
f. $\mathbf{H_2PO_4^-}$

S14.1.5

a. $\mathbf{H_2O_{(l)} + H^+(aq) \longrightarrow H_3O^+(aq)}$
b. $\mathbf{OH^-(aq) + H^+(aq) \longrightarrow H_2O_{(l)}}$
c. $\mathbf{NH_3(aq) + H^+(aq) \longrightarrow NH_4^+(aq)}$;
d. $\mathbf{CN^-(aq) + H^+(aq) \longrightarrow HCN(aq)}$
e. $\mathbf{S^{2-}(aq) + H^+(aq) \longrightarrow HS^-(aq)}$
f. $\mathbf{H_2PO_4^-(aq) + H^+(aq) \longrightarrow H_3PO_4(aq)}$

Q14.1.6

Show by suitable net ionic equations that each of the following species can act as a Brønsted-Lowry base:

a. HS^-
b. $\mathbf{PO_4^{3-}}$
c. $\mathbf{NH_2^-}$
d. C_2H_5OH
e. O^{2-}
f. $\mathbf{H_2PO_4^-}$

Q14.1.7

What is the conjugate acid of each of the following? What is the conjugate base of each?

a. $\mathbf{OH^-}$
b. H_2O
c. $\mathbf{HCO_3^-}$
d. NH_3
e. $\mathbf{HSO_4^-}$
f. H_2O_2
g. HS^-
h. $\mathbf{H_5N_2^+}$

S14.1.7

H_2O, O^{2-}; H_3O^+, $\mathbf{OH^-}$; H_2CO_3, $\mathbf{CO_3^{2-}}$; $\mathbf{NH_4^+}$, $\mathbf{NH_2^-}$; H_2SO_4, $\mathbf{SO_4^{2-}}$; $\mathbf{H_3O_2^+}$, $\mathbf{HO_2^-}$; H_2S; S^{2-}; $\mathbf{H_6N_2^{2+}}$, H_4N_2

Q14.1.8

What is the conjugate acid of each of the following? What is the conjugate base of each?

a. H_2S
b. $\mathbf{H_2PO_4^-}$
c. PH_3
d. HS^-
e. $\mathbf{HSO_3^-}$
f. $\mathbf{H_3O_2^+}$
g. H_4N_2
h. CH_3OH

Q14.1.9

Identify and label the Brønsted-Lowry acid, its conjugate base, the Brønsted-Lowry base, and its conjugate acid in each of the following equations:

a. $\mathbf{HNO_3 + H_2O \longrightarrow H_3O^+ + NO_3^-}$
b. $\mathbf{CN^- + H_2O \longrightarrow HCN + OH^-}$
c. $\mathbf{H_2SO_4 + Cl^- \longrightarrow HCl + HSO_4^-}$
d. $\mathbf{HSO_4^- + OH^- \longrightarrow SO_4^{2-} + H_2O}$

e. $O^{2-} + H_2O \longrightarrow 2\,OH^-$
f. $[Cu(H_2O)_3(OH)]^+ + [Al(H_2O)_6]^{3+} \longrightarrow [Cu(H_2O)_4]^{2+} + [Al(H_2O)_5(OH)]^{2+}$
g. $H_2S + NH_2^- \longrightarrow HS^- + NH_3$

S14.1.9

The labels are Brønsted-Lowry acid = BA; its conjugate base = CB; Brønsted-Lowry base = BB; its conjugate acid = CA. HNO_3(BA), H_2O(BB), H_3O^+(CA), **NO_3^- (CB)**; CN^-(BB), H_2O(BA), HCN(CA), **OH^-** (CB); H_2SO_4(BA), Cl^-(BB), HCl(CA), **HSO_4^- (CB)**; **HSO_4^- (BA)**, OH^-(BB), **SO_4^{2-} (CB)**, H_2O(CA); O^{2-}(BB), H2O(BA) **OH^-** (CB and CA); $[Cu(H_2O)_3(OH)]^+$(BB), $[Al(H_2O)_6]^{3+}$(BA), $[Cu(H_2O)_4]^{2+}$(CA), $[Al(H_2O)_5(OH)]^{2+}$(CB); H_2S(BA), **NH_2^- (BB)**, HS^-(CB), NH_3(CA)

Q14.1.10

Identify and label the Brønsted-Lowry acid, its conjugate base, the Brønsted-Lowry base, and its conjugate acid in each of the following equations:

a. $NO_2^- + H_2O \longrightarrow HNO_2 + OH^-$
b. $HBr + H_2O \longrightarrow H_3O^+ + Br^-$
c. $HS^- + H_2O \longrightarrow H_2S + OH^-$
d. $H_2PO_4^- + OH^- \longrightarrow HPO_4^{2-} + H_2O$
e. $H_2PO_4^- + HCl \longrightarrow H_3PO_4 + Cl^-$
f. $[Fe(H_2O)_5(OH)]^{2+} + [Al(H_2O)_6]^{3+} \longrightarrow [Fe(H_2O)_6]^{3+} + [Al(H_2O)_5(OH)]^{2+}$
g. $CH_3OH + H^- \longrightarrow CH_3O^- + H_2$

Q14.1.11

What are amphiprotic species? Illustrate with suitable equations.

S14.1.11

Amphiprotic species may either gain or lose a proton in a chemical reaction, thus acting as a base or an acid. An example is H_2O.

- As an acid: $H_2O(aq) + NH_3(aq) \rightleftharpoons NH_4^+(aq) + OH^-(aq)$.
- As a base: $H_2O(aq) + HCl(aq) \rightleftharpoons H_3O^+(aq) + Cl^-(aq)$

Q14.1.12

State which of the following species are amphiprotic and write chemical equations illustrating the amphiprotic character of these species:

a. H_2O
b. $H_2PO_4^-$
c. S^{2-}
d. CO_3^{2-}
e. HSO_4^-

Q14.1.13

State which of the following species are amphiprotic and write chemical equations illustrating the amphiprotic character of these species.

a. NH_3
b. HPO_4^-
c. Br^-
d. NH_4^+
e. ASO_4^{3-}

S14.113

amphiprotic: $NH_3 + H_3O^+ \longrightarrow NH_4OH + H_2O$, $NH_3 + OCH_3^- \longrightarrow NH_2^- + CH_3OH$; $HPO_4^{2-} + OH^- \longrightarrow PO_4^{3-} + H_2O$, $HPO_4^{2-} + HClO_4 \longrightarrow H_2PO_4^- + ClO_4^-$; not amphiprotic: Br^-; NH_4^+; AsO_4^{3-}

Q14.1.14

Is the self ionization of water endothermic or exothermic? The ionization constant for water (K_w) is $\mathbf{2.9 \times 10^{-14}}$ at 40 °C and $\mathbf{9.6 \times 10^{-14}}$ at 60 °C.

14.2: pH and pOH

Q14.2.1

Explain why a sample of pure water at 40 °C is neutral even though $[H_3O^+] = 1.7 \times 10^{-7}$ *M*. K_w is 2.9×10^{-14} at 40 °C.

S14.2.1

In a neutral solution $[H_3O^+] = [OH^-]$. At 40 °C,

$[H_3O^+] = [OH^-] = (2.910^{-14})^{1/2} = 1.7 \times 10^{-7}$.

Q14.2.2

The ionization constant for water (K_w) is 2.9×10^{-14} at 40 °C. Calculate $[H_3O^+]$, $[OH^-]$, pH, and pOH for pure water at 40 °C.

Q14.2.3

The ionization constant for water (K_w) is 9.614×10^{-14} at 60 °C. Calculate $[H_3O^+]$, $[OH^-]$, pH, and pOH for pure water at 60 °C.

S14.2.3

x = 3.101×10^{-7} M = $[H_3O^+] = [OH^-]$

pH = -log 3.101×10^{-7} = −(−6.5085) = 6.5085

pOH = pH = 6.5085

Q14.2.4

Calculate the pH and the pOH of each of the following solutions at 25 °C for which the substances ionize completely:

a. 0.200 *M* HCl
b. 0.0143 *M* NaOH
c. 3.0 *M* HNO_3
d. 0.0031 *M* $Ca(OH)_2$

Q14.2.5

Calculate the pH and the pOH of each of the following solutions at 25 °C for which the substances ionize completely:

a. 0.000259 *M* $HClO_4$
b. 0.21 *M* NaOH
c. 0.000071 *M* $Ba(OH)_2$
d. 2.5 *M* KOH

S14.2.5

pH = 3.587; pOH = 10.413; pH = 0.68; pOH = 13.32; pOH = 3.85; pH = 10.15; pH = −0.40; pOH = 14.4

Q14.2.6

What are the pH and pOH of a solution of 2.0 M HCl, which ionizes completely?

Q14.2.6

What are the hydronium and hydroxide ion concentrations in a solution whose pH is 6.52?

S14.2.6

$[H_3O^+] = 3.0 \times 10^{-7}$ *M*; $[OH^-] = 3.3 \times 10^{-8}$ *M*

Q14.2.7

Calculate the hydrogen ion concentration and the hydroxide ion concentration in wine from its pH. See below Figure for useful information.

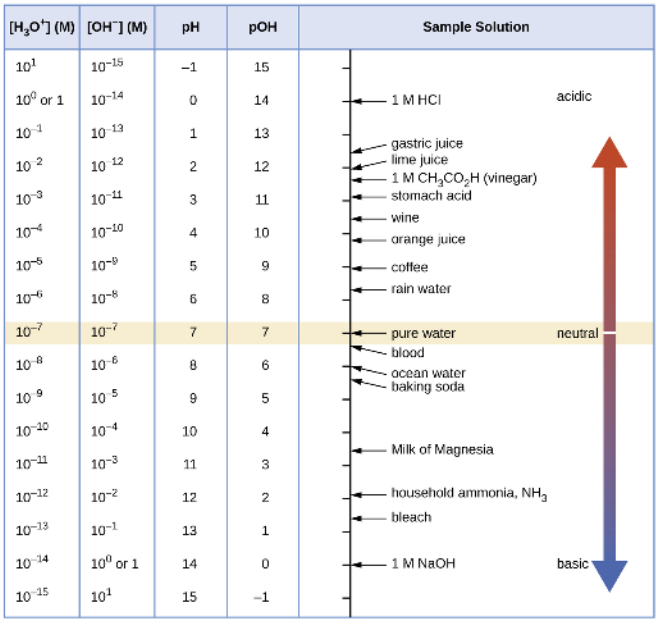

Q14.2.8

Calculate the hydronium ion concentration and the hydroxide ion concentration in lime juice from its pH. See Figure for useful information.

S14.2.9

$[H_3O^+] = 1 \times 10^{-2}\ M$; $[OH^-] = 1 \times 10^{-12}\ M$

Q14.2.9

The hydronium ion concentration in a sample of rainwater is found to be $1.7 \times 10^{-6}\ M$ at 25 °C. What is the concentration of hydroxide ions in the rainwater?

Q14.2.10

The hydroxide ion concentration in household ammonia is $3.2 \times 10^{-3}\ M$ at 25 °C. What is the concentration of hydronium ions in the solution?

S14.2.10

$[OH^-] = 3.1 \times 10^{-12}\ M$

14.3: Relative Strengths of Acids and Bases

Q14.3.1

Explain why the neutralization reaction of a strong acid and a weak base gives a weakly acidic solution.

Q14.3.2

Explain why the neutralization reaction of a weak acid and a strong base gives a weakly basic solution.

The salt ionizes in solution, but the anion slightly reacts with water to form the weak acid. This reaction also forms OH^-, which causes the solution to be basic.

Q14.3.3

Use this list of important industrial compounds (and Figure) to answer the following questions regarding: CaO, $Ca(OH)_2$, CH_3CO_2H, CO_2, HCl, H_2CO_3, HF, HNO_2, HNO_3, H_3PO_4, H_2SO_4, NH_3, NaOH, Na_2CO_3.

a. Identify the strong Brønsted-Lowry acids and strong Brønsted-Lowry bases.
b. List those compounds in that can behave as Brønsted-Lowry acids with strengths lying between those of H_3O^+ and H_2O.
c. List those compounds in that can behave as Brønsted-Lowry bases with strengths lying between those of H_2O and OH^-.

Q14.3.4

The odor of vinegar is due to the presence of acetic acid, CH_3CO_2H, a weak acid. List, in order of descending concentration, all of the ionic and molecular species present in a 1-*M* aqueous solution of this acid.

S14.3.4

$[H_2O] > [CH_3CO_2H] > [\mathbf{H_3O^+}] \approx [\mathbf{CH_3CO_2^-}] > [OH^-]$

Q14.3.5

Household ammonia is a solution of the weak base NH_3 in water. List, in order of descending concentration, all of the ionic and molecular species present in a 1-*M* aqueous solution of this base.

Q14.3.4

Explain why the ionization constant, K_a, for H_2SO_4 is larger than the ionization constant for H_2SO_3.

S14.3.4

The oxidation state of the sulfur in H_2SO_4 is greater than the oxidation state of the sulfur in H_2SO_3.

Q14.3.7

Explain why the ionization constant, K_a, for HI is larger than the ionization constant for HF.

Q14.3.8

Gastric juice, the digestive fluid produced in the stomach, contains hydrochloric acid, HCl. Milk of Magnesia, a suspension of solid $Mg(OH)_2$ in an aqueous medium, is sometimes used to neutralize excess stomach acid. Write a complete balanced equation for the neutralization reaction, and identify the conjugate acid-base pairs.

S14.3.8

$$\underset{\text{BB}}{\mathbf{Mg(OH)_2}}(s) + \underset{\text{BA}}{\mathbf{HCl}}(aq) \longrightarrow \underset{\text{CB}}{\mathbf{Mg^{2+}}}(aq) + 2\,\underset{\text{CA}}{\mathbf{Cl^-}}(aq) + 2\,\mathbf{H_2O}(l)$$

Q14.3.9

Nitric acid reacts with insoluble copper(II) oxide to form soluble copper(II) nitrate, $Cu(NO_3)_2$, a compound that has been used to prevent the growth of algae in swimming pools. Write the balanced chemical equation for the reaction of an aqueous solution of HNO_3 with CuO.

Q14.3.10

What is the ionization constant at 25 °C for the weak acid $\mathbf{CH_3NH_3^+}$, the conjugate acid of the weak base CH_3NH_2, $K_b = 4.4 \times 10^{-4}$.

S14.3.10

$\boldsymbol{K_a = 2.3 \times 10^{-11}}$

Q14.3.11

What is the ionization constant at 25 °C for the weak acid $\mathbf{(CH_3)_2NH_2^+}$, the conjugate acid of the weak base $(CH_3)_2NH$, $K_b = 7.4 \times 10^{-4}$?

Q14.3.12

Which base, CH_3NH_2 or $(CH_3)_2NH$, is the strongest base? Which conjugate acid, $\mathbf{(CH_3)_2NH_2^+}$ or $(CH_3)_2NH$, is the strongest acid?

S14.3.12

The strongest base or strongest acid is the one with the larger K_b or K_a, respectively. In these two examples, they are $(CH_3)_2NH$ and $\mathbf{CH_3NH_3^+}$.

Q14.3.3

Which is the stronger acid, $\mathbf{NH_4^+}$ or HBrO?

Q14.3.14

Which is the stronger base, $(CH_3)_3N$ or $\mathbf{H_2BO_3^-}$?

S14.3.14

triethylamine.

Q14.3.15

Predict which acid in each of the following pairs is the stronger and explain your reasoning for each.

a. H_2O or HF
b. $B(OH)_3$ or $Al(OH)_3$
c. $\mathbf{HSO_3^-}$ or $\mathbf{HSO_4^-}$
d. NH_3 or H_2S
e. H_2O or H_2Te

Q14.3.16

Predict which compound in each of the following pairs of compounds is more acidic and explain your reasoning for each.

a. $\mathbf{HSO_4^-}$ or $\mathbf{HSeO_4^-}$
b. NH_3 or H_2O
c. PH_3 or HI
d. NH_3 or PH_3
e. H_2S or HBr

S14.3.16

a. $\mathbf{HSO_4^-}$; higher electronegativity of the central ion. H_2O;
b. NH_3 is a base and water is neutral, or decide on the basis of K_a values. HI;
c. PH_3 is weaker than HCl; HCl is weaker than HI. Thus, PH_3 is weaker than HI.
d. PH_3; in binary compounds of hydrogen with nonmetals, the acidity increases for the element lower in a group.
e. HBr; in a period, the acidity increases from left to right; in a group, it increases from top to bottom. Br is to the left and below S, so HBr is the stronger acid.

Q14.3.17

Rank the compounds in each of the following groups in order of increasing acidity or basicity, as indicated, and explain the order you assign.

a. acidity: HCl, HBr, HI
b. basicity: H_2O, OH^-, H^-, Cl^-
c. basicity: $Mg(OH)_2$, $Si(OH)_4$, $ClO_3(OH)$ (Hint: Formula could also be written as $HClO_4$).
d. acidity: HF, H_2O, NH_3, CH_4

Q14.3.18

Rank the compounds in each of the following groups in order of increasing acidity or basicity, as indicated, and explain the order you assign.

a. acidity: $NaHSO_3$, $NaHSeO_3$, $NaHSO_4$
b. basicity: $\mathbf{BrO_2^-}$, $\mathbf{ClO_2^-}$, $\mathbf{IO_2^-}$
c. acidity: HOCl, HOBr, HOI
d. acidity: HOCl, HOClO, $HOClO_2$, $HOClO_3$
e. basicity: $\mathbf{NH_2^-}$, HS^-, HTe^-, $\mathbf{PH_2^-}$
f. basicity: BrO^-, $\mathbf{BrO_2^-}$, $\mathbf{BrO_3^-}$, $\mathbf{BrO_4^-}$

S14.3.18

a. $NaHSeO_3 < NaHSO_3 < NaHSO_4$; in polyoxy acids, the more electronegative central element—S, in this case—forms the stronger acid. The larger number of oxygen atoms on the central atom (giving it a higher oxidation state) also creates a greater release of hydrogen atoms, resulting in a stronger acid. As a salt, the acidity increases in the same manner.
b. $\mathbf{ClO_2^- < BrO_2^- < IO_2^-}$; the basicity of the anions in a series of acids will be the opposite of the acidity in their oxyacids. The acidity increases as the electronegativity of the central atom increases. Cl is more electronegative than Br, and I is the least electronegative of the three.
c. HOI < HOBr < HOCl; in a series of the same form of oxyacids, the acidity increases as the electronegativity of the central atom increases. Cl is more electronegative than Br, and I is the least electronegative of the three.
d. HOCl < HOClO < $HOClO_2$ < $HOClO_3$; in a series of oxyacids of the same central element, the acidity increases as the number of oxygen atoms increases (or as the oxidation state of the central atom increases).
e. $\mathbf{HTe^- < HS^- \ll PH_2^- < NH_2^-}$; $\mathbf{PH_2^-}$ and $\mathbf{NH_2^-}$ are anions of weak bases, so they act as strong bases toward H^+. $\mathbf{HTe^-}$ and HS^- are anions of weak acids, so they have less basic character. In a periodic group, the more electronegative element has the more basic anion.
f. $\mathbf{BrO_4^- < BrO_3^- < BrO_2^- < BrO^-}$; with a larger number of oxygen atoms (that is, as the oxidation state of the central ion increases), the corresponding acid becomes more acidic and the anion consequently less basic.

Q14.3.19

Both HF and HCN ionize in water to a limited extent. Which of the conjugate bases, F^- or CN^-, is the stronger base? See Table.

Q14.3.20

The active ingredient formed by aspirin in the body is salicylic acid, $C_6H_4OH(CO_2H)$. The carboxyl group ($-CO_2H$) acts as a weak acid. The phenol group (an OH group bonded to an aromatic ring) also acts as an acid but a much weaker acid. List, in order of descending concentration, all of the ionic and molecular species present in a 0.001-*M* aqueous solution of $C_6H_4OH(CO_2H)$.

$$\mathbf{[H_2O] > [C_6H_4OH(CO_2H)] > [H^+]_0 > [C_6H_4OH(CO_2)^-] \gg [C_6H_4O(CO_2H)^-] > [OH^-]}$$

What do we represent when we write:

$$\mathbf{CH_3CO_2H}(aq) + \mathbf{H_2O}(l) \rightleftharpoons \mathbf{H_3O^+}(aq) + \mathbf{CH_3CO_2^-}(aq)? \tag{13.8.1}$$

Q14.3.21

Explain why equilibrium calculations are not necessary to determine ionic concentrations in solutions of certain strong electrolytes such as NaOH and HCl. Under what conditions are equilibrium calculations necessary as part of the determination of the concentrations of all ions of some other strong electrolytes in solution?

S14.3.21

Strong electrolytes are 100% ionized, and, as long as the component ions are neither weak acids nor weak bases, the ionic species present result from the dissociation of the strong electrolyte. Equilibrium calculations are necessary when one (or more) of the ions is a weak acid or a weak base.

Q14.3.22

Are the concentrations of hydronium ion and hydroxide ion in a solution of an acid or a base in water directly proportional or inversely proportional? Explain your answer.

Q14.3.23

What two common assumptions can simplify calculation of equilibrium concentrations in a solution of a weak acid?

S14.3.23

1. Assume that the change in initial concentration of the acid as the equilibrium is established can be neglected, so this concentration can be assumed constant and equal to the initial value of the total acid concentration.
2. Assume we can neglect the contribution of water to the equilibrium concentration of H_3O^+.

Q14.3.24

What two common assumptions can simplify calculation of equilibrium concentrations in a solution of a weak base?

Q14.3.25

Which of the following will increase the percent of NH_3 that is converted to the ammonium ion in water (Hint: Use LeChâtelier's principle.)?

a. addition of NaOH
b. addition of HCl
c. addition of NH_4Cl

S14.3.25

The addition of HCl

Q14.3.26

Which of the following will increase the percent of HF that is converted to the fluoride ion in water?

a. addition of NaOH
b. addition of HCl
c. addition of NaF

Q14.3.27

What is the effect on the concentrations of $\mathbf{NO_2^-}$, HNO_2, and OH^- when the following are added to a solution of KNO_2 in water:

a. HCl
b. HNO_2
c. NaOH
d. NaCl
e. KNO

The equation for the equilibrium is:

$$\mathbf{NO_2^-}(aq) + \mathbf{H_2O}(l) \rightleftharpoons \mathbf{HNO_2}(aq) + \mathbf{OH^-}(aq) \tag{13.8.2}$$

S14.3.27

a. Adding HCl will add H_3O^+ ions, which will then react with the OH^- ions, lowering their concentration. The equilibrium will shift to the right, increasing the concentration of HNO_2, and decreasing the concentration of $\mathbf{NO_2^-}$ ions.
b. Adding HNO_2 increases the concentration of HNO_2 and shifts the equilibrium to the left, increasing the concentration of $\mathbf{NO_2^-}$ ions and decreasing the concentration of OH^- ions.
c. Adding NaOH adds OH^- ions, which shifts the equilibrium to the left, increasing the concentration of $\mathbf{NO_2^-}$ ions and decreasing the concentrations of HNO_2.
d. Adding NaCl has no effect on the concentrations of the ions.

e. Adding KNO_2 adds $\mathbf{NO_2^-}$ ions and shifts the equilibrium to the right, increasing the HNO_2 and OH^- ion concentrations.

Q14.3.28

What is the effect on the concentration of hydrofluoric acid, hydronium ion, and fluoride ion when the following are added to separate solutions of hydrofluoric acid?

a. HCl
b. KF
c. NaCl
d. KOH
e. HF

The equation for the equilibrium is:

$$\mathbf{HF}(aq) + \mathbf{H_2O}(l) \rightleftharpoons \mathbf{H_3O^+}(aq) + \mathbf{F^-}(aq) \tag{13.8.3}$$

Q14.3.29

Why is the hydronium ion concentration in a solution that is 0.10 *M* in HCl and 0.10 *M* in HCOOH determined by the concentration of HCl?

S14.3.29

This is a case in which the solution contains a mixture of acids of different ionization strengths. In solution, the HCO_2H exists primarily as HCO_2H molecules because the ionization of the weak acid is suppressed by the strong acid. Therefore, the HCO_2H contributes a negligible amount of hydronium ions to the solution. The stronger acid, HCl, is the dominant producer of hydronium ions because it is completely ionized. In such a solution, the stronger acid determines the concentration of hydronium ions, and the ionization of the weaker acid is fixed by the $[H_3O^+]$ produced by the stronger acid.

Q14.3.30

From the equilibrium concentrations given, calculate K_a for each of the weak acids and K_b for each of the weak bases.

CH_3CO_2H: $\mathbf{[H_3O^+]} = 1.34 \times 10^{-3}$ *M*;

$\mathbf{[CH_3CO_2^-]} = 1.34 \times 10^{-3}$ *M*;

$[CH_3CO_2H] = 9.866 \times 10^{-2}$ *M*;

ClO^-: $[OH^-] = 4.0 \times 10^{-4}$ *M*;

$[HClO] = 2.38 \times 10^{-5}$ *M*;

$[ClO^-] = 0.273$ *M*;

HCO_2H: $[HCO_2H] = 0.524$ *M*;

$\mathbf{[H_3O^+]} = 9.8 \times 10^{-3}$ *M*; $\mathbf{[HCO_2^-]} = 9.8 \times 10^{-3}$ *M*;

$\mathbf{C_6H_5NH_3^+}$: $\mathbf{[C_6H_5NH_3^+]} = 0.233$ *M*;

$[C_6H_5NH_2] = 2.3 \times 10^{-3}$ *M*;

$\mathbf{[H_3O^+]} = 2.3 \times 10^{-3}$ *M*

From the equilibrium concentrations given, calculate K_a for each of the weak acids and K_b for each of the weak bases.

NH_3: $[OH^-] = 3.1 \times 10^{-3}$ *M*;

$\mathbf{[NH_4^+]} = 3.1 \times 10^{-3}$ *M*;

$[NH_3] = 0.533$ *M*;

HNO_2: $\mathbf{[H_3O^+]} = 0.011$ *M*;

$\mathbf{[NO_2^-]} = 0.0438$ *M*;

$[HNO_2] = 1.07$ *M*;

$(CH_3)_3N$: $[(CH_3)_3N] = 0.25\ M$;

$[(CH_3)_3NH^+] = 4.3 \times 10^{-3}\ M$;

$[OH^-] = 4.3 \times 10^{-3}\ M$;

$\mathbf{NH_4^+}$: $[NH_4^+] = 0.100\ M$;

$[NH_3] = 7.5 \times 10^{-6}\ M$;

$[H_3O^+] = 7.5 \times 10^{-6}\ M$

a. $K_b = 1.8 \times 10^{-5}$;
b. $K_a = 4.5 \times 10^{-4}$;
c. $K_b = 7.4 \times 10^{-5}$;
d. $K_a = 5.6 \times 10^{-10}$

Q14.3.31

Determine K_b for the nitrite ion, $\mathbf{NO_2^-}$. In a 0.10-*M* solution this base is 0.0015% ionized.

Q14.3.32

Determine K_a for hydrogen sulfate ion, $\mathbf{HSO_4^-}$. In a 0.10-*M* solution the acid is 29% ionized.

S14.3.32

$K_a = 1.2 \times 10^{-2}$

Q14.3.33

Calculate the ionization constant for each of the following acids or bases from the ionization constant of its conjugate base or conjugate acid:

a. F^-
b. $\mathbf{NH_4^+}$
c. $\mathbf{AsO_4^{3-}}$
d. $\mathbf{(CH_3)_2NH_2^+}$
e. $\mathbf{NO_2^-}$
f. $\mathbf{HC_2O_4^-}$ (as a base)

Q14.3.52

Calculate the ionization constant for each of the following acids or bases from the ionization constant of its conjugate base or conjugate acid:

1. HTe^- (as a base)
2. $\mathbf{(CH_3)_3NH^+}$
3. $\mathbf{HAsO_4^{3-}}$ (as a base)
4. $\mathbf{HO_2^-}$ (as a base)
5. $\mathbf{C_6H_5NH_3^+}$
6. $\mathbf{HSO_3^-}$ (as a base)

S14.3.52

a. $K_b = 4.3 \times 10^{-12}$;
b. $K_a = 1.4 \times 10^{-10}$;
c. $K_b = 1 \times 10^{-7}$;
d. $K_b = 4.2 \times 10^{-3}$;
e. $K_b = 4.2 \times 10^{-3}$;
f. $K_b = 8.3 \times 10^{-13}$

Q14.3.53

For which of the following solutions must we consider the ionization of water when calculating the pH or pOH?

a. 3×10^{-8} *M* HNO_3
b. 0.10 g HCl in 1.0 L of solution
c. 0.00080 g NaOH in 0.50 L of solution
d. 1×10^{-7} *M* $Ca(OH)_2$
e. 0.0245 *M* KNO_3

Q14.3.54

Even though both NH_3 and $C_6H_5NH_2$ are weak bases, NH_3 is a much stronger acid than $C_6H_5NH_2$. Which of the following is correct at equilibrium for a solution that is initially 0.10 *M* in NH_3 and 0.10 *M* in $C_6H_5NH_2$?

a. $[OH^-] = [NH_4^+]$
b. $[NH_4^+] = [C_6H_5NH_3^+]$
c. $[OH^-] = [C_6H_5NH_3^+]$
d. $[NH_3] = [C_6H_5NH_2]$
e. both a and b are correct

is the correct statement.

Q14.3.55

Calculate the equilibrium concentration of the nonionized acids and all ions in a solution that is 0.25 *M* in HCO_2H and 0.10 *M* in HClO.

Q14.3.56

Calculate the equilibrium concentration of the nonionized acids and all ions in a solution that is 0.134 *M* in HNO_2 and 0.120 *M* in HBrO.

S14.3.56

$[H_3O^+] = 7.5 \times 10^{-3}$ *M*

$[HNO_2] = 0.126$ $[OH^-] = 1.3 \times 10^{-12}$ *M* $[BrO^-] = 3.2 \times 10^{-8}$ *M* $[HBrO] = 0.120$ *M*

Q14.3.57

Calculate the equilibrium concentration of the nonionized bases and all ions in a solution that is 0.25 *M* in CH_3NH_2 and 0.10 *M* in C_5H_5N ($K_b = 1.7 \times 10^{-9}$).

Q14.3.58

Calculate the equilibrium concentration of the nonionized bases and all ions in a solution that is 0.115 *M* in NH_3 and 0.100 *M* in $C_6H_5NH_2$.

S14.3.58

$[OH^-] = [NO_4^+] = 0.0014$ *M*

$[NH_3] = 0.144$ *M* $[H_3O^+] = 6.9 \times 10^{-12}$ *M* $[C_6H_5NH_3^+] = 3.9 \times 10^{-8}$ *M* $[C_6H_5NH_2] = 0.100$ *M*

Q14.3.59

Using the K_a values in Appendix H, place $Al(H_2O)_6^{3+}$ in the correct location in Figure.

Q14.3.60

Calculate the concentration of all solute species in each of the following solutions of acids or bases. Assume that the ionization of water can be neglected, and show that the change in the initial concentrations can be neglected. Ionization constants can be found in Appendix H and Appendix I.

a. 0.0092 *M* HClO, a weak acid
b. 0.0784 *M* $C_6H_5NH_2$, a weak base
c. 0.0810 *M* HCN, a weak acid
d. 0.11 *M* $(CH_3)_3N$, a weak base
e. 0.120 *M* $\mathbf{Fe(H_2O)_6^{2+}}$ a weak acid, $K_a = 1.6 \times 10^{-7}$

S14.3.60

$$\frac{[H3O+][ClO-]}{[HClO]} = \frac{(x)(x)}{(0.0092 - x)} \approx \frac{(x)(x)}{0.0092} = 3.5 \times 10^{-8}$$

Solving for *x* gives 1.79×10^{-5} *M*. This value is less than 5% of 0.0092, so the assumption that it can be neglected is valid. Thus, the concentrations of solute species at equilibrium are:

$[H_3O^+] = [ClO] = 1.8 \times 10^{-5}$ *M*[HClO] = 0.00092 *M* $[OH^-] = 5.6 \times 10^{-10}$ *M*;

$$\frac{[C6H5NH3+][OH-]}{[C6H5NH2]} = \frac{(x)(x)}{(0.0784 - x)} \approx \frac{(x)(x)}{0.0784} = 4.6 \times 10^{-10}$$

Solving for *x* gives 6.01×10^{-6} *M*.

This value is less than 5% of 0.0784, so the assumption that it can be neglected is valid. Thus, the concentrations of solute species at equilibrium are: $\mathbf{[CH_3CO_2^-]}$ = $[OH^-] = 6.0 \times 10^{-6}$ *M* $[C_6H_5NH_2] = 0.00784$ $[H_3O^+] = 1.7\times 10^{-9}$ *M*; $\frac{[H3O+][CN-]}{[HCN]} = \frac{(x)(x)}{(0.0810 - x)} \approx \frac{(x)(x)}{0.0810} = 4 \times 10^{-10}$ Solving for *x* gives 5.69×10^{-6} *M*. This value is less than 5% of 0.0810, so the assumption that it can be neglected is valid. Thus, the concentrations of solute species at equilibrium are: $[H_3O^+] = [CN^-] = 5.7 \times 10^{-6}$ *M* [HCN] = 0.0810 *M* $[OH^-] = 1.8 \times 10^{-9}$ *M*; $\frac{[(CH3)3NH+][OH-]}{[(CH3)3N]} = \frac{(x)(x)}{(0.11 - x)} \approx \frac{(x)(x)}{0.11} = 7.4 \times 10^{-5}$ Solving for *x* gives 2.85×10^{-3} *M*. This value is less than 5% of 0.11, so the assumption that it can be neglected is valid. Thus, the concentrations of solute species at equilibrium are: $[(CH_3)_3NH^+] = [OH^-] = 2.9 \times 10^{-3}$ *M* $[(CH_3)_3N] = 0.11$ *M* $[H_3O^+] = 3.5 \times 10^{-12}$ *M*; $\frac{[Fe(H2O)5(OH)+][H3O+]}{[Fe(H2O)6^2+]} = \frac{(x)(x)}{(0.120 - x)} \approx \frac{(x)(x)}{0.120} = 1.6 \times 10^{-7}$ Solving for *x* gives 1.39×10^{-4} *M*. This value is less than 5% of 0.120, so the assumption that it can be neglected is valid. Thus, the concentrations of solute species at equilibrium are: $[Fe(H_2O)_5(OH)^+] = [H_3O^+] = 1.4 \times 10^{-4}$ *M* $\mathbf{[Fe(H_2O)_6^{2+}]} = 0.120$ *M* $[OH^-] = 7.2 \times 10^{-11}$ *M*

Q14.3.61

Propionic acid, $C_2H_5CO_2H$ ($K_a = 1.34 \times 10^{-5}$), is used in the manufacture of calcium propionate, a food preservative. What is the hydronium ion concentration in a 0.698-*M* solution of $C_2H_5CO_2H$?

Q14.3.62

White vinegar is a 5.0% by mass solution of acetic acid in water. If the density of white vinegar is 1.007 g/cm^3, what is the pH?

S14.3.62

pH = 2.41

Q14.3.63

The ionization constant of lactic acid, $CH_3CH(OH)CO_2H$, an acid found in the blood after strenuous exercise, is 1.36×10^{-4}. If 20.0 g of lactic acid is used to make a solution with a volume of 1.00 L, what is the concentration of hydronium ion in the solution?

Q14.3.64

Nicotine, $C_{10}H_{14}N_2$, is a base that will accept two protons ($K_1 = 7 \times 10^{-7}$, $K_2 = 1.4 \times 10^{-11}$). What is the concentration of each species present in a 0.050-*M* solution of nicotine?

S14.3.64

$[C_{10}H_{14}N_2] = 0.049$ *M*

$[C_{10}H_{14}N_2H^+] = 1.9 \times 10^{-4}$ *M* $\mathbf{[C_{10}H_{14}N_2H_2^{2+}]} = 1.4 \times 10^{-11}$ *M* $[OH^-] = 1.9 \times 10^{-4}$ *M* $[H_3O^+] = 5.3 \times 10^{-11}$ *M*

Q14.3.65

The pH of a 0.20-*M* solution of HF is 1.92. Determine K_a for HF from these data.

Q14.3.66

The pH of a 0.15-*M* solution of $\mathbf{HSO_4^-}$ is 1.43. Determine K_a for $\mathbf{HSO_4^-}$ from these data.

S14.3.66

$\boldsymbol{K_a = 1.2 \times 10^{-2}}$

Q14.3.67

The pH of a 0.10-*M* solution of caffeine is 11.16. Determine K_b for caffeine from these data:

$$\mathbf{C_8H_{10}N_4O_2}(aq) + \mathbf{H_2O}(l) \rightleftharpoons \mathbf{C_8H_{10}N_4O_2H^+}(aq) + \mathbf{OH^-}(aq)$$

Q14.3.68

The pH of a solution of household ammonia, a 0.950 M solution of NH_3, is 11.612. Determine K_b for NH_3 from these data.

S14.3.68

$\boldsymbol{K_b = 1.77 \times 10^{-5}}$

14.4: Hydrolysis of Salt Solutions

Q14.4.1

Determine whether aqueous solutions of the following salts are acidic, basic, or neutral:

a. $Al(NO_3)_3$
b. RbI
c. $KHCO_2$
d. CH_3NH_3Br

Q14.4.2

Determine whether aqueous solutions of the following salts are acidic, basic, or neutral:

a. $FeCl_3$
b. K_2CO_3
c. NH_4Br
d. $KClO_4$

S14.4.2

acidic; basic; acidic; neutral

Q14.4.3

Novocaine, $C_{13}H_{21}O_2N_2Cl$, is the salt of the base procaine and hydrochloric acid. The ionization constant for procaine is 7×10^{-6}. Is a solution of novocaine acidic or basic? What are $[H_3O^+]$, $[OH^-]$, and pH of a 2.0% solution by mass of novocaine, assuming that the density of the solution is 1.0 g/mL.

14.5: Polyprotic Acids

Q15.5.1

Which of the following concentrations would be practically equal in a calculation of the equilibrium concentrations in a 0.134-*M* solution of H_2CO_3, a diprotic acid:

- $\mathbf{[H_3O^+]}$,
- $[\boldsymbol{OH^-}]$
- $[\boldsymbol{H_2CO_3}]$

- $[HCO_3^-]$
- $[CO_3^{2-}]$

No calculations are needed to answer this question.

S15.5.1

$[H_3O^+]$ and $[HCO_3^-]$ are equal, H_3O^+ and HCO_3^- are practically equal

Q15.5.2

Calculate the concentration of each species present in a 0.050-*M* solution of H_2S.

Q15.5.3

Calculate the concentration of each species present in a 0.010-*M* solution of phthalic acid, $C_6H_4(CO_2H)_2$.

S15.5.3

$$C_6H_4(CO_2H)_2(aq) + H_2O(l) \rightleftharpoons H_3O^+(aq) + C_6H_4(CO_2H)(CO_2)^-(aq) \quad K_a = 1.1 \times 10^{-3}$$

$$C_6H_4(CO_2H)(CO_2)(aq) + H_2O(l) \rightleftharpoons H_3O^+(aq) + C_6H_4(CO_2)_2^{2-}(aq) \quad K_a = 3.9 \times 10^{-6}$$

$[C_6H_4(CO_2H)_2]$ 7.2×10^{-3} *M*, $[C_6H_4(CO_2H)(CO_2)^-] = [H_3O^+]$ 2.8×10^{-3} *M*, $[C_6H_4(CO_2)_2^{2-}]$ 3.9×10^{-6} *M*, $[OH^-]$ 3.6×10^{-12} *M*

Q15.5.4

Salicylic acid, $HOC_6H_4CO_2H$, and its derivatives have been used as pain relievers for a long time. Salicylic acid occurs in small amounts in the leaves, bark, and roots of some vegetation (most notably historically in the bark of the willow tree). Extracts of these plants have been used as medications for centuries. The acid was first isolated in the laboratory in 1838.

1. Both functional groups of salicylic acid ionize in water, with $K_a = 1.0 \times 10^{-3}$ for the—CO_2H group and 4.2×10^{-13} for the −OH group. What is the pH of a saturated solution of the acid (solubility = 1.8 g/L).
2. Aspirin was discovered as a result of efforts to produce a derivative of salicylic acid that would not be irritating to the stomach lining. Aspirin is acetylsalicylic acid, $CH_3CO_2C_6H_4CO_2H$. The $-CO_2H$ functional group is still present, but its acidity is reduced, $K_a = 3.0 \times 10^{-4}$. What is the pH of a solution of aspirin with the same concentration as a saturated solution of salicylic acid (See Part a).
3. Under some conditions, aspirin reacts with water and forms a solution of salicylic acid and acetic acid:

$$CH_3CO_2C_6H_4CO_2H(aq) + H_2O(l) \longrightarrow HOC_6H_4CO_2H(aq) + CH_3CO_2H(aq) \tag{13.8.4}$$

   i. Which of the acids salicylic acid or acetic acid produces more hydronium ions in solution such a solution?
   ii. What are the concentrations of molecules and ions in a solution produced by the hydrolysis of 0.50 g of aspirin dissolved in enough water to give 75 mL of solution?

Q15.5.5

The ion HTe^- is an amphiprotic species; it can act as either an acid or a base.

a. What is K_a for the acid reaction of HTe^- with H_2O?
b. What is K_b for the reaction in which HTe^- functions as a base in water?
c. Demonstrate whether or not the second ionization of H_2Te can be neglected in the calculation of $[HTe^-]$ in a 0.10 M solution of H_2Te.

S15.5.5

a. $K_{a2} = 1 \times 10^{-5}$;
b. $K_b = 4.3 \times 10^{-12}$;
c. $\frac{[Te^{2-}][H3O+]}{[HTe-]} = \frac{(x)(0.0141 + x)}{(0.0141 - x)} \approx \frac{(x)(0.0141)}{0.0141} = 1 \times 10^{-5}$. Solving for *x* gives 1×10^{-5} *M*. Therefore, compared with 0.014 *M*, this value is negligible (0.071%).

14.6: Buffers

Q14.6.1

Explain why a buffer can be prepared from a mixture of NH_4Cl and NaOH but not from NH_3 and NaOH.

Q14.6.2

Explain why the pH does not change significantly when a small amount of an acid or a base is added to a solution that contains equal amounts of the acid H_3PO_4 and a salt of its conjugate base NaH_2PO_4.

S14.6.2

Excess H_3O^+ is removed primarily by the reaction:

$\mathbf{H_3O^+(aq) + H_2PO_4^-(aq) \longrightarrow H_3PO_4(aq) + H_2O(l)}$ Excess base is removed by the reaction: $\mathbf{OH^-(aq) + H_3PO_4(aq) \longrightarrow H_2PO_4^-(aq) + H_2O(l)}$

Q14.6.3

Explain why the pH does not change significantly when a small amount of an acid or a base is added to a solution that contains equal amounts of the base NH_3 and a salt of its conjugate acid NH_4Cl.

Q14.6.4

What is $[H_3O^+]$ in a solution of 0.25 *M* CH_3CO_2H and 0.030 *M* $NaCH_3CO_2$?

$\mathbf{CH_3CO_2H(aq) + H_2O(l) \rightleftharpoons H_3O^+(aq) + CH_3CO_2^-(aq) \quad K_a = 1.8 \times 10^{-5}}$

S14.6.4

$[H_3O^+] = 1.5 \times 10^{-4}\ M$

Q14.6.5

What is $[H_3O^+]$ in a solution of 0.075 *M* HNO_2 and 0.030 *M* $NaNO_2$?

S14.6.6

$\mathbf{HNO_2(aq) + H_2O(l) \rightleftharpoons H_3O^+(aq) + NO_2^-(aq) \quad K_a = 4.5 \times 10^{-5}}$

Q14.6.6

What is $[OH^-]$ in a solution of 0.125 *M* CH_3NH_2 and 0.130 *M* CH_3NH_3Cl?

S14.6.6

$\mathbf{CH_3NH_2(aq) + H_2O(l) \rightleftharpoons CH_3NH_3^+(aq) + OH^-(aq) \quad K_b = 4.4 \times 10^{-4}}$

$[OH^-] = 4.2 \times 10^{-4}\ M$

Q14.6.7

What is $[OH^-]$ in a solution of 1.25 *M* NH_3 and 0.78 *M* NH_4NO_3?

S14.6.7

$\mathbf{NH_3(aq) + H_2O(l) \rightleftharpoons NH_4^+(aq) + OH^-(aq) \quad K_b = 1.8 \times 10^{-5}}$

Q14.6.8

What concentration of NH_4NO_3 is required to make $[OH^-] = 1.0 \times 10^{-5}$ in a 0.200-*M* solution of NH_3?

S14.6.8

$[NH_4NO_3] = 0.36\ M$

Q14.6.9A

What concentration of NaF is required to make $[H_3O^+] = 2.3 \times 10^{-4}$ in a 0.300-*M* solution of HF?

Q14.6.9B

What is the effect on the concentration of acetic acid, hydronium ion, and acetate ion when the following are added to an acidic buffer solution of equal concentrations of acetic acid and sodium acetate:

a. HCl
b. KCH_3CO_2
c. NaCl
d. KOH
e. CH_3CO_2H

S14.6.10

a. The added HCl will increase the concentration of H_3O^+ slightly, which will react with $\mathbf{CH_3CO_2^-}$ and produce CH_3CO_2H in the process. Thus, $[\mathbf{CH_3CO_2^-}]$ decreases and $[CH_3CO_2H]$ increases.
b. The added KCH_3CO_2 will increase the concentration of $[\mathbf{CH_3CO_2^-}]$ which will react with H_3O^+ and produce CH_3CO_2 H in the process. Thus, $[H_3O^+]$ decreases slightly and $[CH_3CO_2H]$ increases.
c. The added NaCl will have no effect on the concentration of the ions.
d. The added KOH will produce OH^- ions, which will react with the H_3O^+, thus reducing $[H_3O^+]$. Some additional CH_3CO_2H will dissociate, producing $[\mathbf{CH_3CO_2^-}]$ ions in the process. Thus, $[CH_3CO_2H]$ decreases slightly and $[\mathbf{CH_3CO_2^-}]$ increases.
e. The added CH_3CO_2H will increase its concentration, causing more of it to dissociate and producing more $[\mathbf{CH_3CO_2^-}]$ and H_3O^+ in the process. Thus, $[H_3O^+]$ increases slightly and $[\mathbf{CH_3CO_2^-}]$ increases.

Q14.6.11

What is the effect on the concentration of ammonia, hydroxide ion, and ammonium ion when the following are added to a basic buffer solution of equal concentrations of ammonia and ammonium nitrate:

a. KI
b. NH_3
c. HI
d. NaOH
e. NH_4Cl

What will be the pH of a buffer solution prepared from 0.20 mol NH_3, 0.40 mol NH_4NO_3, and just enough water to give 1.00 L of solution?

pH = 8.95

Calculate the pH of a buffer solution prepared from 0.155 mol of phosphoric acid, 0.250 mole of KH_2PO_4, and enough water to make 0.500 L of solution.

How much solid $NaCH_3CO_2 \cdot 3H_2O$ must be added to 0.300 L of a 0.50-*M* acetic acid solution to give a buffer with a pH of 5.00? (Hint: Assume a negligible change in volume as the solid is added.)

37 g (0.27 mol)

What mass of NH_4Cl must be added to 0.750 L of a 0.100-*M* solution of NH_3 to give a buffer solution with a pH of 9.26? (Hint: Assume a negligible change in volume as the solid is added.)

Q14.6.1

A buffer solution is prepared from equal volumes of 0.200 *M* acetic acid and 0.600 *M* sodium acetate. Use 1.80×10^{-5} as K_a for acetic acid.

1. What is the pH of the solution?
2. Is the solution acidic or basic?

Q14.6.1

What is the pH of a solution that results when 3.00 mL of 0.034 *M* HCl is added to 0.200 L of the original buffer?

a. pH = 5.222;
b. The solution is acidic. (c) pH = 5.221

Q14.6.1

A 5.36–g sample of NH_4Cl was added to 25.0 mL of 1.00 *M* NaOH and the resulting solution diluted to 0.100 L.

a. What is the pH of this buffer solution?
b. Is the solution acidic or basic?
c. What is the pH of a solution that results when 3.00 mL of 0.034 *M* HCl is added to the solution?

Which acid in [link] is most appropriate for preparation of a buffer solution with a pH of 3.1? Explain your choice.

To prepare the best buffer for a weak acid HA and its salt, the ratio $\frac{[H_3O^+]}{K_a}$ should be as close to 1 as possible for effective buffer action. The $[H_3O^+]$ concentration in a buffer of pH 3.1 is $[H_3O^+] = 10^{-3.1} = 7.94 \times 10^{-4}$ *M*

We can now solve for K_a of the best acid as follows:

$$\frac{[H_3O^+]}{K_a} = 1$$

$$K_a = \frac{[H_3O^+]}{1} = 7.94 \times 10^{-4}$$

In [link], the acid with the closest K_a to 7.94×10^{-4} is HF, with a K_a of 7.2×10^{-4}.

Which acid in [link] is most appropriate for preparation of a buffer solution with a pH of 3.7? Explain your choice.

Which base in [link] is most appropriate for preparation of a buffer solution with a pH of 10.65? Explain your choice.

For buffers with pHs > 7, you should use a weak base and its salt. The most effective buffer will have a ratio $\frac{[OH^-]}{K_b}$ that is as close to 1 as possible. The pOH of the buffer is 14.00 − 10.65 = 3.35. Therefore, $[OH^-]$ is $[OH^-] = 10^{-pOH} = 10^{-3.35} = 4.467 \times 10^{-4}$ *M*.

We can now solve for K_b of the best base as follows: $\frac{[OH^-]}{K_b} = 1$ $K_b = [OH^-] = 4.47 \times 10^{-4}$ In [link], the base with the closest K_b to 4.47×10^{-4} is CH_3NH_2, with a $K_b = 4.4 \times 10^{-4}$.

Which base in [link] is most appropriate for preparation of a buffer solution with a pH of 9.20? Explain your choice.

Q14.6.4

Saccharin, $C_7H_4NSO_3H$, is a weak acid ($K_a = 2.1 \times 10^{-2}$). If 0.250 L of diet cola with a buffered pH of 5.48 was prepared from 2.00×10^{-3} g of sodium saccharide, $Na(C_7H_4NSO_3)$, what are the final concentrations of saccharine and sodium saccharide in the solution?

S14.6.4

The molar mass of sodium saccharide is 205.169 g/mol. Using the abbreviations HA for saccharin and NaA for sodium saccharide the number of moles of NaA in the solution is:

9.75×10^{-6} mol. This ionizes initially to form saccharin ions, A^-, with: $[A^-] = 3.9 \times 10^{-5}$ *M*

Q14.6.5

What is the pH of 1.000 L of a solution of 100.0 g of glutamic acid ($C_5H_9NO_4$, a diprotic acid; $K_1 = 8.5 \times 10^{-5}$, $K_2 = 3.39 \times 10^{-10}$) to which has been added 20.0 g of NaOH during the preparation of monosodium glutamate, the flavoring agent? What is the pH when exactly 1 mol of NaOH per mole of acid has been added?

14.7: Acid-Base Titrations

Q14.7.1

Explain how to choose the appropriate acid-base indicator for the titration of a weak base with a strong acid.

S14.7.1

At the equivalence point in the titration of a weak base with a strong acid, the resulting solution is slightly acidic due to the presence of the conjugate acid. Thus, pick an indicator that changes color in the acidic range and brackets the pH at the equivalence point. Methyl orange is a good example.

Q14.7.2

Explain why an acid-base indicator changes color over a range of pH values rather than at a specific pH.

Q14.7.3

Why can we ignore the contribution of water to the concentrations of H_3O^+ in the solutions of following acids:

- 0.0092 *M* HClO, a weak acid
- 0.0810 *M* HCN, a weak acid
- 0.120 *M* $\mathbf{Fe(H_2O)_6^{2+}}$ a weak acid, $K_a = 1.6 \times 10^{-7}$

but not the contribution of water to the concentration of OH^-?

S14.7.3

In an acid solution, the only source of OH^- ions is water. We use K_w to calculate the concentration. If the contribution from water was neglected, the concentration of OH^- would be zero.

Q14.7.4

We can ignore the contribution of water to the concentration of OH^- in a solution of the following bases:

0.0784 *M* $C_6H_5NH_2$, a weak base

0.11 *M* $(CH_3)_3N$, a weak base

but not the contribution of water to the concentration of H_3O^+?

Q14.7.5

Draw a curve for a series of solutions of HF. Plot $[H_3O^+]_{total}$ on the vertical axis and the total concentration of HF (the sum of the concentrations of both the ionized and nonionized HF molecules) on the horizontal axis. Let the total concentration of HF vary from 1×10^{-10} *M* to 1×10^{-2} *M*.

A graph is shown that is titled “Plot of [H subscript 3 O superscript +] Against [H F].” The horizontal axis is labeled “[H F], M.” The axis begins at 10 superscript negative 10 and includes markings every 10 superscript 2 units up to 1.0. The vertical axis is labeled “[H subscript 3 O superscript plus], M” and begins at 10 superscript negative 10 and increases by 10 superscript 2 up to 1.0. A black curve starts at the left side of the graph at (10 superscript negative 10, 10 superscript negative 7). The line extends horizontally to a horizontal axis value of 10 superscript negative 8. After this, the line gradually increases at a steady rate to a value just over 10 superscript negative 3 at a horizontal axis value of 10 superscript negative 2.

Q14.7.6

Draw a curve similar to that shown in Figure for a series of solutions of NH_3. Plot $[OH^-]$ on the vertical axis and the total concentration of NH_3 (both ionized and nonionized NH_3 molecules) on the horizontal axis. Let the total concentration of NH_3 vary from 1×10^{-10} *M* to 1×10^{-2} *M*.

Q14.7.7

Calculate the pH at the following points in a titration of 40 mL (0.040 L) of 0.100 *M* barbituric acid ($K_a = 9.8 \times 10^{-5}$) with 0.100 *M* KOH.

1. no KOH added
2. 20 mL of KOH solution added
3. 39 mL of KOH solution added
4. 40 mL of KOH solution added
5. 41 mL of KOH solution added

S14.7.7

1. pH = 2.50;
2. pH = 4.01;
3. pH = 5.60;
4. pH = 8.35;
5. pH = 11.08

Q14.7.8

The indicator dinitrophenol is an acid with a K_a of 1.1×10^{-4}. In a 1.0×10^{-4}-M solution, it is colorless in acid and yellow in base. Calculate the pH range over which it goes from 10% ionized (colorless) to 90% ionized (yellow).

This page titled 13.8: Acid-Base Equilibria (Exercises) is shared under a CC BY license and was authored, remixed, and/or curated by OpenStax.

CHAPTER OVERVIEW

14: Nuclear Chemistry

A general chemistry Libretexts Textmap organized around the textbook
General Chemistry -Atoms First
By OpenStax

I *II* *III* *IV* *V* *VI* *VII* *VIII* *IX* *X* *XI* *XII* *XIII* *XIV* *XV* *XVI* *XVII* *XVIII* *XIX* *XX* *XXI* ● **Homework**

The chemical reactions that we have considered in previous chapters involve changes in the *electronic* structure of the species involved, that is, the arrangement of the **electrons** around atoms, ions, or molecules. *Nuclear* structure, the numbers of protons and neutrons within the nuclei of the atoms involved, remains unchanged during chemical reactions. This chapter will introduce the topic of nuclear chemistry, which began with the discovery of radioactivity in 1896 by French physicist Antoine Becquerel and has become increasingly important during the twentieth and twenty-first centuries, providing the basis for various technologies related to energy, medicine, geology, and many other areas.

Topic hierarchy

14.1: Nuclear Structure and Stability
14.2: Nuclear Equations
14.3: Radioactive Decay
14.4: Transmutation and Nuclear Energy
14.5: Uses of Radioisotopes
14.6: Biological Effects of Radiation
14.7: Nuclear Chemistry (Exercises)

Contributors

- Paul Flowers (University of North Carolina - Pembroke), Klaus Theopold (University of Delaware) and Richard Langley (Stephen F. Austin State University) with contributing authors. Textbook content produced by OpenStax College is licensed under a Creative Commons Attribution License 4.0 license. Download for free at http://cnx.org/contents/85abf193-2bd...a7ac8df6@9.110).

This page titled 14: Nuclear Chemistry is shared under a CC BY license and was authored, remixed, and/or curated by OpenStax.

14.1: Nuclear Structure and Stability

Learning Objectives

- Describe nuclear structure in terms of protons, neutrons, and electrons
- Calculate mass defect and binding energy for nuclei
- Explain trends in the relative stability of nuclei

Nuclear chemistry is the study of reactions that involve changes in nuclear structure. The chapter on atoms, molecules, and ions introduced the basic idea of nuclear structure, that the nucleus of an atom is composed of protons and, with the exception of ${}^{1}_{1}\mathrm{H}$, neutrons. Recall that the number of protons in the nucleus is called the atomic number (Z) of the element, and the sum of the number of protons and the number of neutrons is the mass number (A). Atoms with the same atomic number but different mass numbers are isotopes of the same element. When referring to a single type of nucleus, we often use the term **nuclide** and identify it by the notation:

$$ {}^{A}_{Z}\mathrm{X} \tag{14.1.1}$$

where

- X is the symbol for the element,
- A is the mass number, and
- Z is the atomic number.

Often a nuclide is referenced by the name of the element followed by a hyphen and the mass number. For example, ${}^{14}_{6}\mathrm{C}$ is called "carbon-14."

Protons and neutrons, collectively called **nucleons**, are packed together tightly in a nucleus. With a radius of about 10^{-15} meters, a nucleus is quite small compared to the radius of the entire atom, which is about 10^{-10} meters. Nuclei are extremely dense compared to bulk matter, averaging 1.8×10^{14} grams per cubic centimeter. For example, water has a density of 1 gram per cubic centimeter, and iridium, one of the densest elements known, has a density of 22.6 g/cm^3. If the earth's density were equal to the average nuclear density, the earth's radius would be only about 200 meters (earth's actual radius is approximately 6.4×10^6 meters, 30,000 times larger). Example 14.1.1 demonstrates just how great nuclear densities can be in the natural world.

To hold positively charged protons together in the very small volume of a nucleus requires very strong attractive forces because the positively charged protons repel one another strongly at such short distances. The force of attraction that holds the nucleus together is the strong nuclear force. (The strong force is one of the four fundamental forces that are known to exist. The others are the electromagnetic force, the gravitational force, and the nuclear weak force.) This force acts between protons, between neutrons, and between protons and neutrons. It is very different from the electrostatic force that holds negatively charged electrons around a positively charged nucleus (the attraction between opposite charges). Over distances less than 10^{-15} meters and within the nucleus, the strong nuclear force is much stronger than electrostatic repulsions between protons; over larger distances and outside the nucleus, it is essentially nonexistent.

Nuclear Binding Energy

As a simple example of the energy associated with the strong nuclear force, consider the helium atom composed of two protons, two neutrons, and two electrons. However, mass spectrometric measurements reveal that the mass of an ${}^{4}_{2}\mathrm{He}$ atom is 4.0026 amu, less than the combined masses of its six constituent subatomic particles. This difference between the calculated and experimentally measured masses is known as the mass defect of the atom. In the case of helium, the mass defect indicates a "loss" in mass of 4.0331 amu – 4.0026 amu = 0.0305 amu. The loss in mass accompanying the formation of an atom from protons, neutrons, and electrons is due to the conversion of that mass into energy that is evolved as the atom forms. The nuclear binding energy is the energy produced when the atoms' nucleons are bound together; this is also the energy needed to break a nucleus into its constituent protons and neutrons. In comparison to chemical bond energies, nuclear binding energies are *vastly* greater, as we will learn in this section. Consequently, the energy changes associated with nuclear reactions are vastly greater than are those for chemical reactions.

The conversion between mass and energy is most identifiably represented by the mass-energy equivalence equation as stated by Albert Einstein:

$$E = mc^2 \tag{14.1.2}$$

where E is energy, m is mass of the matter being converted, and c is the speed of light in a vacuum. This equation can be used to find the amount of energy that results when matter is converted into energy. Using this mass-energy equivalence equation, the nuclear binding energy of a nucleus may be calculated from its **mass defect**, as demonstrated in Example **14.1.2**. A variety of units are commonly used for nuclear binding energies, including electron volts (eV), with 1 eV equaling the amount of energy necessary to the move the charge of an electron across an electric potential difference of 1 volt, making $\mathbf{1\ eV = 1.602 \times 10^{-19}\ J}$.

Because the energy changes for breaking and forming bonds are so small compared to the energy changes for breaking or forming nuclei, the changes in mass during all ordinary chemical reactions are virtually undetectable. As described in the chapter on thermochemistry, the most energetic chemical reactions exhibit enthalpies on the order of *thousands* of kJ/mol, which is equivalent to mass differences in the nanogram range (10^{-9} g). On the other hand, nuclear binding energies are typically on the order of *billions* of kJ/mol, corresponding to mass differences in the milligram range (10^{-3} g).

Nuclear Stability

A nucleus is stable if it cannot be transformed into another configuration without adding energy from the outside. Of the thousands of nuclides that exist, about 250 are stable. A plot of the number of neutrons versus the number of protons for stable nuclei reveals that the stable isotopes fall into a narrow band. This region is known as the band of stability (also called the belt, zone, or valley of stability). The straight line in Figure **14.1.1** represents nuclei that have a 1:1 ratio of protons to neutrons (n:p ratio). Note that the lighter stable nuclei, in general, have equal numbers of protons and neutrons. For example, nitrogen-14 has seven protons and seven neutrons. Heavier stable nuclei, however, have increasingly more neutrons than protons. For example: iron-56 has 30 neutrons and 26 protons, an n:p ratio of 1.15, whereas the stable nuclide lead-207 has 125 neutrons and 82 protons, an n:p ratio equal to 1.52. This is because larger nuclei have more proton-proton repulsions, and require larger numbers of neutrons to provide compensating strong forces to overcome these electrostatic repulsions and hold the nucleus together.

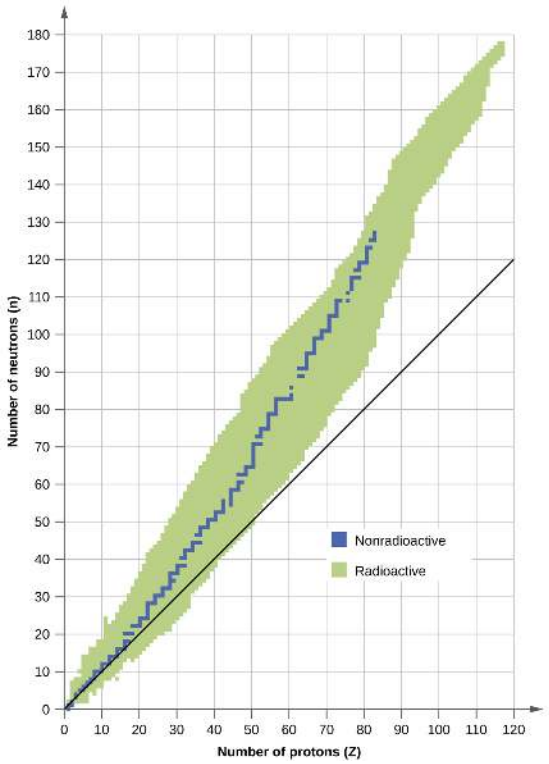

Figure **14.1.1**: This plot shows the nuclides that are known to exist and those that are stable. The stable nuclides are indicated in blue, and the unstable nuclides are indicated in green. Note that all isotopes of elements with atomic numbers greater than 83 are unstable. The solid line is the line where n = Z.

The nuclei that are to the left or to the right of the band of stability are unstable and exhibit radioactivity. They change spontaneously (decay) into other nuclei that are either in, or closer to, the band of stability. These nuclear decay reactions convert

one unstable isotope (or radioisotope) into another, more stable, isotope. We will discuss the nature and products of this radioactive decay in subsequent sections of this chapter.

Several observations may be made regarding the relationship between the stability of a nucleus and its structure. Nuclei with even numbers of protons, neutrons, or both are more likely to be stable (Table 14.1.1). Nuclei with certain numbers of nucleons, known as **magic numbers**, are stable against nuclear decay. These numbers of protons or neutrons (2, 8, 20, 28, 50, 82, and 126) make complete shells in the nucleus. These are similar in concept to the stable electron shells observed for the noble gases. Nuclei that have magic numbers of both protons and neutrons, such as $^{4}_{2}\mathrm{He}$, $^{16}_{8}\mathrm{O}$, $^{40}_{20}\mathrm{Ca}$, and $^{208}_{82}\mathrm{Pb}$ and are particularly stable. These trends in nuclear stability may be rationalized by considering a quantum mechanical model of nuclear energy states analogous to that used to describe electronic states earlier in this textbook. The details of this model are beyond the scope of this chapter.

Table 14.1.1: Stable Nuclear Isotopes

Number of Stable Isotopes	Proton Number	Neutron Number
157	even	even
53	even	odd
50	odd	even
5	odd	odd

The relative stability of a nucleus is correlated with its binding energy per nucleon, the total binding energy for the nucleus divided by the number or nucleons in the nucleus. For instance, the binding energy for a $^{4}_{2}\mathrm{He}$ nucleus is therefore:

$$\frac{28.4\ \text{MeV}}{4\ \text{nucleons}} = 7.10\ \text{MeV/nucleon} \tag{14.1.3}$$

The binding energy per nucleon of a nuclide on the curve shown in Figure 14.1.2

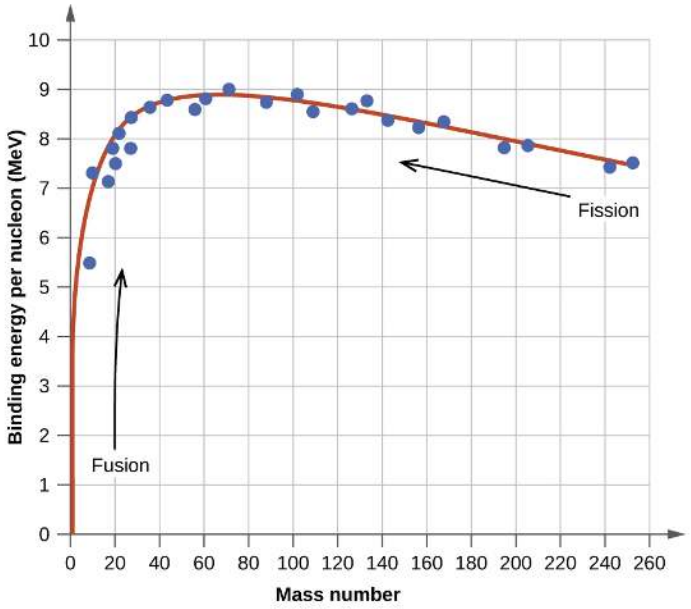

Figure 14.1.2: The binding energy per nucleon is largest for nuclides with mass number of approximately 56.

Summary

An atomic nucleus consists of protons and neutrons, collectively called nucleons. Although protons repel each other, the nucleus is held tightly together by a short-range, but very strong, force called the strong nuclear force. A nucleus has less mass than the total mass of its constituent nucleons. This “missing” mass is the mass defect, which has been converted into the binding energy that holds the nucleus together according to Einstein’s mass-energy equivalence equation, $E = mc^2$. Of the many nuclides that exist,

only a small number are stable. Nuclides with even numbers of protons or neutrons, or those with magic numbers of nucleons, are especially likely to be stable. These stable nuclides occupy a narrow band of stability on a graph of number of protons versus number of neutrons. The binding energy per nucleon is largest for the elements with mass numbers near 56; these are the most stable nuclei.

Key Equations

- $E = mc^2$

Glossary

band of stability
(also, belt of stability, zone of stability, or valley of stability) region of graph of number of protons versus number of neutrons containing stable (nonradioactive) nuclides

binding energy per nucleon
total binding energy for the nucleus divided by the number of nucleons in the nucleus

electron volt (eV)
measurement unit of nuclear binding energies, with 1 eV equaling the amount energy due to the moving an electron across an electric potential difference of 1 volt

magic number
nuclei with specific numbers of nucleons that are within the band of stability

mass defect
difference between the mass of an atom and the summed mass of its constituent subatomic particles (or the mass “lost” when nucleons are brought together to form a nucleus)

mass-energy equivalence equation
Albert Einstein’s relationship showing that mass and energy are equivalent

nuclear binding energy
energy lost when an atom’s nucleons are bound together (or the energy needed to break a nucleus into its constituent protons and neutrons)

nuclear chemistry
study of the structure of atomic nuclei and processes that change nuclear structure

nucleon
collective term for protons and neutrons in a nucleus

nuclide
nucleus of a particular isotope

radioactivity
phenomenon exhibited by an unstable nucleon that spontaneously undergoes change into a nucleon that is more stable; an unstable nucleon is said to be radioactive

radioisotope
isotope that is unstable and undergoes conversion into a different, more stable isotope

strong nuclear force
force of attraction between nucleons that holds a nucleus together

Contributors

- Paul Flowers (University of North Carolina - Pembroke), Klaus Theopold (University of Delaware) and Richard Langley (Stephen F. Austin State University) with contributing authors. Textbook content produced by OpenStax College is licensed under a Creative Commons Attribution License 4.0 license. Download for free at http://cnx.org/contents/85abf193-2bd...a7ac8df6@9.110).

This page titled 14.1: Nuclear Structure and Stability is shared under a CC BY license and was authored, remixed, and/or curated by OpenStax.

14.2: Nuclear Equations

Learning Objectives

- Identify common particles and energies involved in nuclear reactions
- Write and balance nuclear equations

Changes of nuclei that result in changes in their atomic numbers, mass numbers, or energy states are nuclear reactions. To describe a nuclear reaction, we use an equation that identifies the nuclides involved in the reaction, their mass numbers and atomic numbers, and the other particles involved in the reaction.

Types of Particles in Nuclear Reactions

Many entities can be involved in nuclear reactions. The most common are protons, neutrons, alpha particles, beta particles, positrons, and gamma rays, as shown in Figure **14.2.1**. Protons ($_1^1\mathrm{p}$, also represented by the symbol $_1^1\mathrm{H}$) and neutrons ($_0^1\mathrm{n}$) are the constituents of atomic nuclei, and have been described previously. Alpha particles ($_2^4\mathrm{He}$, also represented by the symbol $_2^4\alpha$) are high-energy helium nuclei. Beta particles ($_{-1}^0\beta$, also represented by the symbol $_{-1}^0\mathrm{e}$) are high-energy electrons, and gamma rays are photons of very high-energy electromagnetic radiation. Positrons ($_{+1}^0\mathrm{e}$, also represented by the symbol $_{+1}^0\beta$) are positively charged electrons ("anti-electrons"). The subscripts and superscripts are necessary for balancing nuclear equations, but are usually optional in other circumstances. For example, an alpha particle is a helium nucleus (He) with a charge of +2 and a mass number of 4, so it is symbolized $_2^4\mathrm{He}$. This works because, in general, the ion charge is not important in the balancing of nuclear equations.

Figure **14.2.1**: Although many species are encountered in nuclear reactions, this table summarizes the names, symbols, representations, and descriptions of the most common of these.

This table has four columns and seven rows. The first row is a header row and it labels each column: "Name," "Symbol(s)," "Representation," and "Description." Under the "Name" column are the following: "Alpha particle," "Beta particle," "Positron," "Proton," "Neutron," and "Gamma ray." Under the "Symbol(s)" column are the following: " superscript 4 stacked over a subscript 2 H e or lowercase alpha," "superscript 0 stacked over a subscript 1 e or lowercase beta," "superscript 0 stacked over a positive subscript 1 e or lowercase beta superscript positive sign," "superscript 1 stacked over a subscript 1 H or lowercase rho superscript 1 stacked over a subscript 1 H," "superscript 1 stacked over a subscript 0 n or lowercase eta superscript 1 stacked over a subscript 0 n," and a lowercase gamma. Under the "Representation column," are the following: two white sphere attached to two blue spheres of about the same size with positive signs in them; a small red sphere with a negative sign in it; a small red sphere with a positive sign in it; a blue spheres with a positive sign in it; a white sphere; and a purple squiggle ling with an arrow pointing right to a lowercase gamma. Under the "Description" column are the following: "(High-energy) helium nuclei consisting of two protons and two neutrons," "(High-energy) elections," "Particles with the same mass as an electron but with 1 unit of positive charge," "Nuclei of hydrogen atoms," "Particles with a mass approximately equal to that of a proton but with no charge," and "Very high-energy electromagnetic radiation."

Note that positrons are exactly like electrons, except they have the opposite charge. They are the most common example of antimatter, particles with the same mass but the opposite state of another property (for example, charge) than ordinary matter. When antimatter encounters ordinary matter, both are annihilated and their mass is converted into energy in the form of gamma rays (γ)—and other much smaller subnuclear particles, which are beyond the scope of this chapter—according to the mass-energy equivalence equation $E = mc^2$, seen in the preceding section. For example, when a positron and an electron collide, both are annihilated and two gamma ray photons are created:

$$_{-1}^0\mathrm{e} + {}_{+1}^0\mathrm{e} \rightarrow \gamma + \gamma \tag{14.2.1}$$

Gamma rays compose short wavelength, high-energy electromagnetic radiation and are (much) more energetic than better-known X-rays. Gamma rays are produced when a nucleus undergoes a transition from a higher to a lower energy state, similar to how a photon is produced by an electronic transition from a higher to a lower energy level. Due to the much larger energy differences between nuclear energy shells, gamma rays emanating from a nucleus have energies that are typically millions of times larger than electromagnetic radiation emanating from electronic transitions.

Balancing Nuclear Reactions

A balanced chemical reaction equation reflects the fact that during a chemical reaction, bonds break and form, and atoms are rearranged, but the total numbers of atoms of each element are conserved and do not change. A balanced nuclear reaction equation indicates that there is a rearrangement during a nuclear reaction, but of subatomic particles rather than atoms. Nuclear reactions also follow conservation laws, and they are balanced in two ways:

1. The sum of the mass numbers of the reactants equals the sum of the mass numbers of the products.
2. The sum of the charges of the reactants equals the sum of the charges of the products.

If the atomic number and the mass number of all but one of the particles in a nuclear reaction are known, we can identify the particle by balancing the reaction. For instance, we could determine that $^{17}_{8}\mathrm{O}$ is a product of the nuclear reaction of $^{14}_{7}\mathrm{N}$ and $^{4}_{2}\mathrm{He}$ if we knew that a proton, $^{1}_{1}\mathrm{H}$, was one of the two products. Example **14.2.1** shows how we can identify a nuclide by balancing the nuclear reaction.

Example 14.2.1: Balancing Equations for Nuclear Reactions

The reaction of an α particle with magnesium-25 ($^{25}_{12}\mathrm{Mg}$) produces a proton and a nuclide of another element. Identify the new nuclide produced.

Solution

The nuclear reaction can be written as:

$$^{25}_{12}\mathrm{Mg} + {}^{4}_{2}\mathrm{He} \rightarrow {}^{1}_{1}\mathrm{H} + {}^{A}_{Z}\mathrm{X}$$

where

- **A** is the mass number and
- **Z** is the atomic number of the new nuclide, **X**.

Because the sum of the mass numbers of the reactants must equal the sum of the mass numbers of the products:

$$25 + 4 = A + 1$$

so

$$A = 28$$

Similarly, the charges must balance, so:

$$12 + 2 = Z + 1$$

so

$$Z = 13$$

Check the periodic table: The element with nuclear charge = +13 is aluminum. Thus, the product is $^{28}_{13}\mathrm{Al}$.

Exercise 14.2.1

The nuclide $^{125}_{53}\mathrm{I}$ combines with an electron and produces a new nucleus and no other massive particles. What is the equation for this reaction?

Answer

$$^{125}_{53}\mathrm{I} + {}^{0}_{-1}\mathrm{e} \rightarrow {}^{125}_{52}\mathrm{Te}$$

Following are the equations of several nuclear reactions that have important roles in the history of nuclear chemistry:

- The first naturally occurring unstable element that was isolated, polonium, was discovered by the Polish scientist Marie Curie and her husband Pierre in 1898. It decays, emitting α particles:

$$^{212}_{84}\text{Po} \longrightarrow {}^{208}_{82}\text{Pb} + {}^{4}_{2}\text{He}$$

- The first nuclide to be prepared by artificial means was an isotope of oxygen, ^{17}O. It was made by Ernest Rutherford in 1919 by bombarding nitrogen atoms with α particles:

$$^{14}_{7}\text{N} + {}^{4}_{2}\alpha \longrightarrow {}^{17}_{8}\text{O} + {}^{1}_{1}\text{H}$$

- James Chadwick discovered the neutron in 1932, as a previously unknown neutral particle produced along with ^{12}C by the nuclear reaction between ^{9}Be and ^{4}He:

$$^{9}_{4}\text{Be} + {}^{4}_{2}\text{He} \longrightarrow {}^{12}_{6}\text{C} + {}^{1}_{0}\text{n}$$

- The first element to be prepared that does not occur naturally on the earth, technetium, was created by bombardment of molybdenum by deuterons (heavy hydrogen, $^{2}_{1}\text{H}$), by Emilio Segre and Carlo Perrier in 1937:

$$^{2}_{1}\text{H} + {}^{97}_{42}\text{Mo} \longrightarrow 2{}^{1}_{0}\text{n} + {}^{97}_{43}\text{Tc}$$

- The first controlled nuclear chain reaction was carried out in a reactor at the University of Chicago in 1942. One of the many reactions involved was:

$$^{235}_{92}\text{U} + {}^{1}_{0}\text{n} \longrightarrow {}^{87}_{35}\text{Br} + {}^{146}_{57}\text{La} + 3{}^{1}_{0}\text{n}$$

Summary

Nuclei can undergo reactions that change their number of protons, number of neutrons, or energy state. Many different particles can be involved in nuclear reactions. The most common are protons, neutrons, positrons (which are positively charged electrons), alpha (α) particles (which are high-energy helium nuclei), beta (β) particles (which are high-energy electrons), and gamma (γ) rays (which compose high-energy electromagnetic radiation). As with chemical reactions, nuclear reactions are always balanced. When a nuclear reaction occurs, the total mass (number) and the total charge remain unchanged.

Glossary

alpha particle

(α or $^{4}_{2}\text{He}$ or $^{4}_{2}\alpha$) high-energy helium nucleus; a helium atom that has lost two electrons and contains two protons and two neutrons

antimatter

particles with the same mass but opposite properties (such as charge) of ordinary particles

beta particle

(β or $^{0}_{-1}\text{e}$ or $^{0}_{-1}\beta$) high-energy electron

gamma ray

(γ or $^{0}_{0}\gamma$) short wavelength, high-energy electromagnetic radiation that exhibits wave-particle duality

nuclear reaction

change to a nucleus resulting in changes in the atomic number, mass number, or energy state

positron ($^{0}_{+1}\beta$ or $^{0}_{+1}\text{e}$)

antiparticle to the electron; it has identical properties to an electron, except for having the opposite (positive) charge

---

This page titled 14.2: Nuclear Equations is shared under a CC BY license and was authored, remixed, and/or curated by OpenStax.

- **21.2: Nuclear Equations** by OpenStax is licensed CC BY 4.0. Original source: https://openstax.org/details/books/chemistry-2e.

14.3: Radioactive Decay

Learning Objectives

- Recognize common modes of radioactive decay
- Identify common particles and energies involved in nuclear decay reactions
- Write and balance nuclear decay equations
- Calculate kinetic parameters for decay processes, including half-life
- Describe common radiometric dating techniques

Following the somewhat serendipitous discovery of radioactivity by Becquerel, many prominent scientists began to investigate this new, intriguing phenomenon. Among them were Marie Curie (the first woman to win a Nobel Prize, and the only person to win two Nobel Prizes in different sciences—chemistry and physics), who was the first to coin the term "radioactivity," and Ernest Rutherford (of gold foil experiment fame), who investigated and named three of the most common types of radiation. During the beginning of the twentieth century, many radioactive substances were discovered, the properties of radiation were investigated and quantified, and a solid understanding of radiation and nuclear decay was developed.

The spontaneous change of an unstable nuclide into another is radioactive decay. The unstable nuclide is called the parent nuclide; the nuclide that results from the decay is known as the daughter nuclide. The daughter nuclide may be stable, or it may decay itself. The radiation produced during radioactive decay is such that the daughter nuclide lies closer to the band of stability than the parent nuclide, so the location of a nuclide relative to the band of stability can serve as a guide to the kind of decay it will undergo (Figure **14.3.1**).

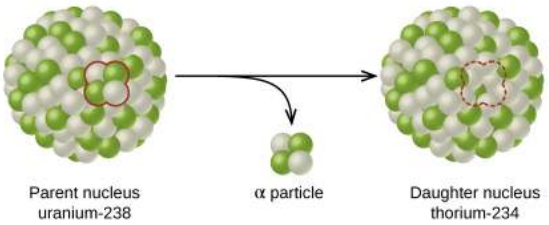

Figure **14.3.1**: A nucleus of uranium-238 (the parent nuclide) undergoes α decay to form thorium-234 (the daughter nuclide). The alpha particle removes two protons (green) and two neutrons (gray) from the uranium-238 nucleus.

Although the radioactive decay of a nucleus is too small to see with the naked eye, we can indirectly view radioactive decay in an environment called a cloud chamber. Click here to learn about cloud chambers and to view an interesting Cloud Chamber Demonstration from the Jefferson Lab.

Video* 14.3.1*: *How to Build a Cloud Chamber!*

Ernest Rutherford's experiments involving the interaction of radiation with a magnetic or electric field (Figure **14.3.2**) helped him determine that one type of radiation consisted of positively charged and relatively massive α particles; a second type was made up of negatively charged and much less massive β particles; and a third was uncharged electromagnetic waves, γ rays. We now know that α particles are high-energy helium nuclei, β particles are high-energy electrons, and γ radiation compose high-energy electromagnetic radiation. We classify different types of radioactive decay by the radiation produced.

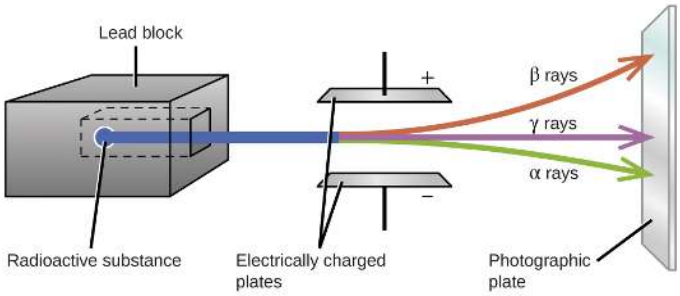

Figure **14.3.2**: Alpha particles, which are attracted to the negative plate and deflected by a relatively small amount, must be positively charged and relatively massive. Beta particles, which are attracted to the positive plate and deflected a relatively large amount, must be negatively charged and relatively light. Gamma rays, which are unaffected by the electric field, must be uncharged.

Alpha (α) decay is the emission of an α particle from the nucleus. For example, polonium-210 undergoes α decay:

$$^{210}_{84}\text{Po} \longrightarrow {}^{4}_{2}\text{He} + {}^{206}_{82}\text{Pb} \qquad {}^{210}_{84}\text{Po} \longrightarrow {}^{4}_{2}\alpha + {}^{206}_{82}\text{Pb} \tag{14.3.1}$$

Alpha decay occurs primarily in heavy nuclei (A > 200, Z > 83). Because the loss of an α particle gives a daughter nuclide with a mass number four units smaller and an atomic number two units smaller than those of the parent nuclide, the daughter nuclide has a larger n:p ratio than the parent nuclide. If the parent nuclide undergoing α decay lies below **the band of stability**, the daughter nuclide will lie closer to the band.

Beta (β) decay is the emission of an electron from a nucleus. Iodine-131 is an example of a nuclide that undergoes β decay:

$$^{131}_{53}\text{I} \longrightarrow {}^{0}_{-1}\text{e} + {}^{131}_{54}\text{X} \qquad {}^{131}_{53}\text{I} \longrightarrow {}^{0}_{-1}\beta + {}^{131}_{54}\text{Xe} \tag{14.3.2}$$

Beta decay, which can be thought of as the conversion of a neutron into a proton and a β particle, is observed in nuclides with a large n:p ratio. The beta particle (electron) emitted is from the atomic nucleus and is not one of the electrons surrounding the nucleus. Such nuclei lie above the band of stability. Emission of an electron does not change the mass number of the nuclide but does increase the number of its protons and decrease the number of its neutrons. Consequently, the n:p ratio is decreased, and the daughter nuclide lies closer to the band of stability than did the parent nuclide.

Gamma emission (γ emission) is observed when a nuclide is formed in an excited state and then decays to its ground state with the emission of a γ ray, a quantum of high-energy electromagnetic radiation. The presence of a nucleus in an excited state is often indicated by an asterisk (*). Cobalt-60 emits γ radiation and is used in many applications including cancer treatment:

$$^{60}_{27}\text{Co}^{*} \longrightarrow {}^{0}_{0}\gamma + {}^{60}_{27}\text{Co} \tag{14.3.3}$$

There is no change in mass number or atomic number during the emission of a γ ray unless the γ emission accompanies one of the other modes of decay.

Positron emission (β^+ decay) is the emission of a positron from the nucleus. Oxygen-15 is an example of a nuclide that undergoes positron emission:

$$^{15}_{8}\text{O} \longrightarrow {}^{0}_{+1}\text{e} + {}^{15}_{7}\text{N} \qquad {}^{15}_{8}\text{O} \longrightarrow {}^{0}_{+1}\beta + {}^{15}_{7}\text{N} \tag{14.3.4}$$

Positron emission is observed for nuclides in which the n:p ratio is low. These nuclides lie below the band of stability. Positron decay is the conversion of a proton into a neutron with the emission of a positron. The n:p ratio increases, and the daughter nuclide

lies closer to the band of stability than did the parent nuclide.

Electron capture occurs when one of the inner electrons in an atom is captured by the atom's nucleus. For example, potassium-40 undergoes electron capture:

$$^{40}_{19}\mathrm{K} + {}^{0}_{-1}\mathrm{e} \longrightarrow {}^{40}_{18}\mathrm{Ar} \tag{14.3.5}$$

Electron capture occurs when an inner shell electron combines with a proton and is converted into a neutron. The loss of an inner shell electron leaves a vacancy that will be filled by one of the outer electrons. As the outer electron drops into the vacancy, it will emit energy. In most cases, the energy emitted will be in the form of an X-ray. Like positron emission, electron capture occurs for "proton-rich" nuclei that lie below the band of stability. Electron capture has the same effect on the nucleus as does positron emission: The atomic number is decreased by one and the mass number does not change. This increases the n:p ratio, and the daughter nuclide lies closer to the band of stability than did the parent nuclide. Whether electron capture or positron emission occurs is difficult to predict. The choice is primarily due to kinetic factors, with the one requiring the smaller activation energy being the one more likely to occur. Figure **14.3.3** summarizes these types of decay, along with their equations and changes in atomic and mass numbers.

Type	Nuclear equation	Representation	Change in mass/atomic numbers
Alpha decay	${}^{A}_{Z}\mathrm{X} \rightarrow {}^{4}_{2}\mathrm{He} + {}^{A-4}_{Z-2}\mathrm{Y}$	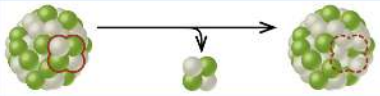	A: decrease by 4 Z: decrease by 2
Beta decay	${}^{A}_{Z}\mathrm{X} \rightarrow {}^{0}_{-1}\mathrm{e} + {}^{A}_{Z+1}\mathrm{Y}$	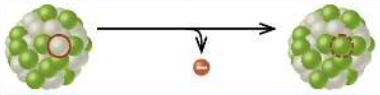	A: unchanged Z: increase by 1
Gamma decay	${}^{A}_{Z}\mathrm{X} \rightarrow {}^{0}_{0}\gamma + {}^{A}_{Z}\mathrm{Y}$	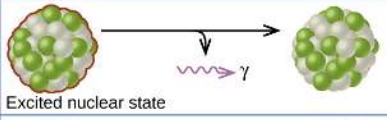	A: unchanged Z: unchanged
Positron emission	${}^{A}_{Z}\mathrm{X} \rightarrow {}^{0}_{+1}\mathrm{e} + {}^{A}_{Y-1}\mathrm{Y}$	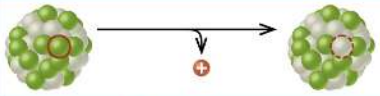	A: unchanged Z: decrease by 1
Electron capture	${}^{A}_{Z}\mathrm{X} \rightarrow {}^{0}_{-1}\mathrm{e} + {}^{A}_{Y-1}\mathrm{Y}$	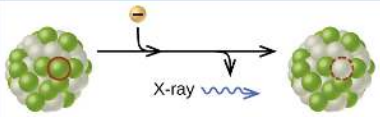	A: unchanged Z: decrease by 1

Figure **14.3.3**: This table summarizes the type, nuclear equation, representation, and any changes in the mass or atomic numbers for various types of decay.

PET Scan

Positron emission tomography (PET) scans use radiation to diagnose and track health conditions and monitor medical treatments by revealing how parts of a patient's body function (Figure **14.3.4**). To perform a PET scan, a positron-emitting radioisotope is produced in a cyclotron and then attached to a substance that is used by the part of the body being investigated. This "tagged" compound, or radiotracer, is then put into the patient (injected via IV or breathed in as a gas), and how it is used by the tissue reveals how that organ or other area of the body functions.

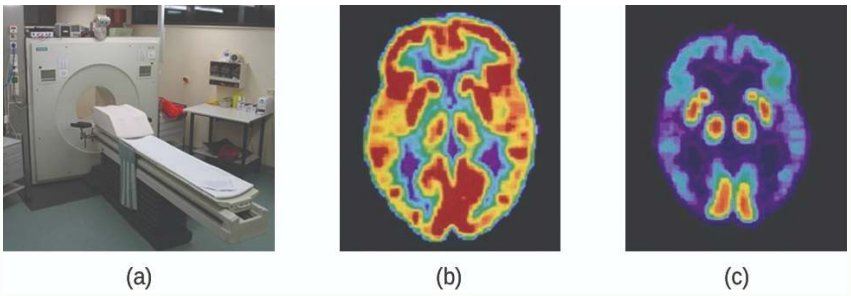

Figure **14.3.4**: A PET scanner (a) uses radiation to provide an image of how part of a patient's body functions. The scans it produces can be used to image a healthy brain (b) or can be used for diagnosing medical conditions such as Alzheimer's disease (c). (credit a: modification of work by Jens Maus)</

For example, F-18 is produced by proton bombardment of ^{18}O ($^{18}_{8}O + {}^{1}_{1}p \longrightarrow {}^{18}_{9}F + {}^{1}_{0}n$) and incorporated into a glucose analog called fludeoxyglucose (FDG). How FDG is used by the body provides critical diagnostic information; for example, since cancers use glucose differently than normal tissues, FDG can reveal cancers. The ^{18}F emits positrons that interact with nearby electrons, producing a burst of gamma radiation. This energy is detected by the scanner and converted into a detailed, three-dimensional, color image that shows how that part of the patient's body functions. Different levels of gamma radiation produce different amounts of brightness and colors in the image, which can then be interpreted by a radiologist to reveal what is going on. PET scans can detect heart damage and heart disease, help diagnose Alzheimer's disease, indicate the part of a brain that is affected by epilepsy, reveal cancer, show what stage it is, and how much it has spread, and whether treatments are effective. Unlike magnetic resonance imaging and X-rays, which only show how something looks, the big advantage of PET scans is that they show how something functions. PET scans are now usually performed in conjunction with a computed tomography scan.

Radioactive Decay Series

The naturally occurring radioactive isotopes of the heaviest elements fall into chains of successive disintegrations, or decays, and all the species in one chain constitute a radioactive family, or radioactive decay series. Three of these series include most of the naturally radioactive elements of the periodic table. They are the uranium series, the actinide series, and the thorium series. The neptunium series is a fourth series, which is no longer significant on the earth because of the short half-lives of the species involved. Each series is characterized by a parent (first member) that has a long half-life and a series of daughter nuclides that ultimately lead to a stable end-product—that is, a nuclide on the band of stability (Figure **14.3.5**). In all three series, the end-product is a stable isotope of lead. The neptunium series, previously thought to terminate with bismuth-209, terminates with thallium-205.

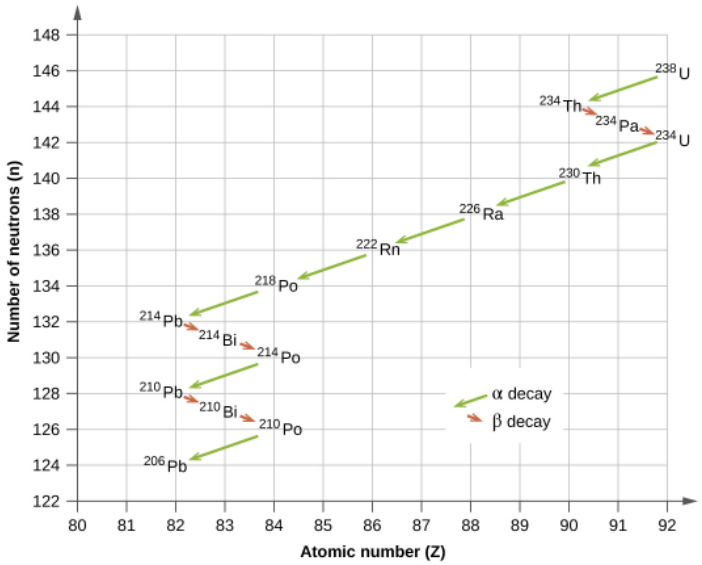

Figure **14.3.5**: Uranium-238 undergoes a radioactive decay series consisting of 14 separate steps before producing stable lead-206. This series consists of eight α decays and six β decays.

Radioactive Half-Lives

Radioactive decay follows first-order kinetics. Since first-order reactions have already been covered in detail in the kinetics chapter, we will now apply those concepts to nuclear decay reactions. Each radioactive nuclide has a characteristic, constant half-life ($t_{1/2}$), the time required for half of the atoms in a sample to decay. An isotope's half-life allows us to determine how long a sample of a useful isotope will be available, and how long a sample of an undesirable or dangerous isotope must be stored before it decays to a low-enough radiation level that is no longer a problem.

For example, cobalt-60, an isotope that emits gamma rays used to treat cancer, has a half-life of 5.27 years (Figure **14.3.6**). In a given cobalt-60 source, since half of the $^{60}_{27}\mathrm{Co}$ nuclei decay every 5.27 years, both the amount of material and the intensity of the radiation emitted is cut in half every 5.27 years. (Note that for a given substance, the intensity of radiation that it produces is directly proportional to the rate of decay of the substance and the amount of the substance.) This is as expected for a process following first-order kinetics. Thus, a cobalt-60 source that is used for cancer treatment must be replaced regularly to continue to be effective.

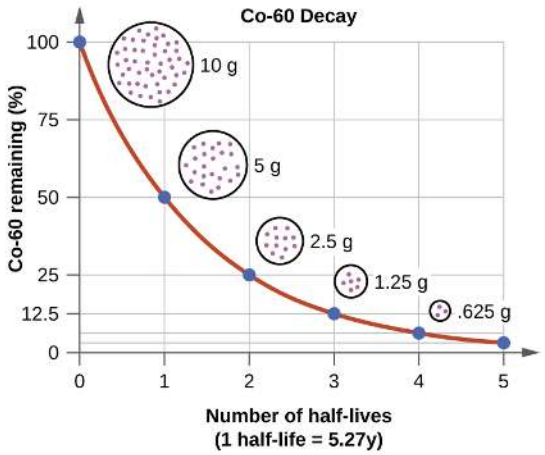

Figure **14.3.6**: For cobalt-60, which has a half-life of 5.27 years, 50% remains after 5.27 years (one half-life), 25% remains after 10.54 years (two half-lives), 12.5% remains after 15.81 years (three half-lives), and so on.

Because each nuclide has a specific number of nucleons, a particular balance of repulsion and attraction, and its own degree of stability, the half-lives of radioactive nuclides vary widely. For example: the half-life of $^{209}_{83}\mathrm{Bi}$ is 1.9×10^{19} years; $^{239}_{94}\mathrm{Ra}$ is 24,000 years; $^{222}_{86}\mathrm{Rn}$ is 3.82 days; and element-111 (Rg for roentgenium) is 1.5×10^{-3} seconds. The half-lives of a number of radioactive isotopes important to medicine are shown in Table **14.3.1**, and others are listed in Appendix N1.

Table **14.3.1**: Half-lives of Radioactive Isotopes Important to Medicine

Type	Decay Mode	Half-Life	Uses
F-18	β^+ decay	110. minutes	PET scans
Co-60	β decay, γ decay	5.27 years	cancer treatment
Tc-99m[1]	γ decay	8.01 hours	scans of brain, lung, heart, bone
I-131	β decay	8.02 days	thyroid scans and treatment
Tl-201	electron capture	73 hours	heart and arteries scans; cardiac stress tests

The "m" in Tc-99m stands for "metastable," indicating that this is an unstable, high-energy state of Tc-99. Metastable isotopes emit γ radiation to rid themselves of excess energy and become (more) stable.

Radiometric Dating

Several radioisotopes have half-lives and other properties that make them useful for purposes of “dating” the origin of objects such as archaeological artifacts, formerly living organisms, or geological formations. This process is radiometric dating and has been responsible for many breakthrough scientific discoveries about the geological history of the earth, the evolution of life, and the history of human civilization. We will explore some of the most common types of radioactive dating and how the particular isotopes work for each type.

Radioactive Dating Using Carbon-14

The radioactivity of carbon-14 provides a method for dating objects that were a part of a living organism. This method of radiometric dating, which is also called radiocarbon dating or carbon-14 dating, is accurate for dating carbon-containing substances that are up to about 30,000 years old, and can provide reasonably accurate dates up to a maximum of about 50,000 years old.

Naturally occurring carbon consists of three isotopes: $^{12}_{6}\text{C}$, which constitutes about 99% of the carbon on earth; $^{13}_{6}\text{C}$, about 1% of the total; and trace amounts of $^{14}_{6}\text{C}$. Carbon-14 forms in the upper atmosphere by the reaction of nitrogen atoms with neutrons from cosmic rays in space:

$$^{14}_{7}\text{N} + {}^{1}_{0}\text{n} \longrightarrow {}^{14}_{6}\text{C} + {}^{1}_{1}\text{H} \tag{14.3.6}$$

All isotopes of carbon react with oxygen to produce CO_2 molecules. The ratio of $^{14}_{6}\text{CO}_2$ to $^{12}_{6}\text{CO}_2$ depends on the ratio of $^{14}_{6}\text{CO}$ to $^{12}_{6}\text{CO}$ in the atmosphere. The natural abundance of $^{14}_{6}\text{CO}$ in the atmosphere is approximately 1 part per trillion; until recently, this has generally been constant over time, as seen is gas samples found trapped in ice. The incorporation of $^{14}_{6}\text{C}$ $^{14}_{6}\text{CO}_2$ and $^{12}_{6}\text{CO}_2$ into plants is a regular part of the photosynthesis process, which means that the $^{14}_{6}\text{C}:\ ^{12}_{6}\text{C}$ ratio found in a living plant is the same as the $^{14}_{6}\text{C}:\ ^{12}_{6}\text{C}$ ratio in the atmosphere. But when the plant dies, it no longer traps carbon through photosynthesis. Because $^{12}_{6}\text{C}$ is a stable isotope and does not undergo radioactive decay, its concentration in the plant does not change. However, carbon-14 decays by β emission with a half-life of 5730 years:

$$^{14}_{6}\text{C} \longrightarrow {}^{14}_{7}\text{N} + {}^{0}_{-1}\text{e} \tag{14.3.7}$$

Thus, the $^{14}_{6}\text{C}:\ ^{12}_{6}\text{C}$ ratio gradually decreases after the plant dies. The decrease in the ratio with time provides a measure of the time that has elapsed since the death of the plant (or other organism that ate the plant). Figure **14.3.7** visually depicts this process.

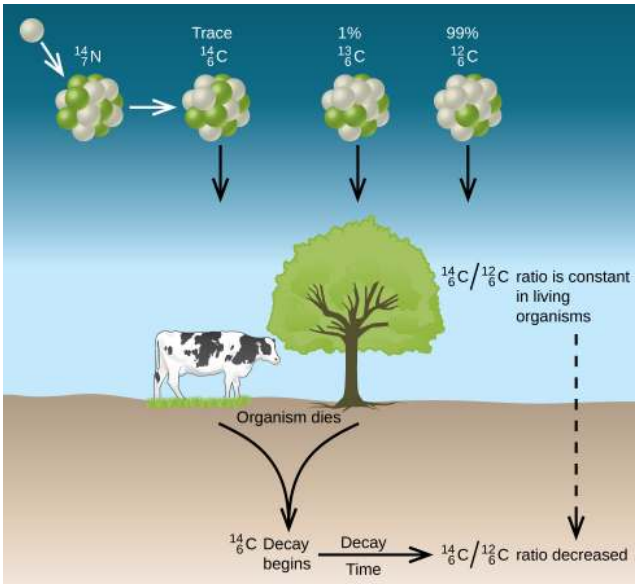

Figure **14.3.7**: Along with stable carbon-12, radioactive carbon-14 is taken in by plants and animals, and remains at a constant level within them while they are alive. After death, the C-14 decays and the C-14:C-12 ratio in the remains decreases. Comparing this ratio to the C-14:C-12 ratio in living organisms allows us to determine how long ago the organism lived (and died).

For example, with the half-life of $^{14}_{6}\text{C}$ being 5730 years, if the $^{14}_{6}\text{C}:\ ^{12}_{6}\text{C}$ ratio in a wooden object found in an archaeological dig is half what it is in a living tree, this indicates that the wooden object is 5730 years old. Highly accurate determinations of $^{14}_{6}\text{C}:\ ^{12}_{6}\text{C}$ ratios can be obtained from very small samples (as little as a milligram) by the use of a mass spectrometer.

Example 14.3.2: Radiocarbon Dating

A tiny piece of paper (produced from formerly living plant matter) taken from the Dead Sea Scrolls has an activity of 10.8 disintegrations per minute per gram of carbon. If the initial C-14 activity was 13.6 disintegrations/min/g of C, estimate the age of the Dead Sea Scrolls.

Solution

The rate of decay (number of disintegrations/minute/gram of carbon) is proportional to the amount of radioactive C-14 left in the paper, so we can substitute the rates for the amounts, *N*, in the relationship:

$$t = -\frac{1}{\lambda}\ln\left(\frac{N_t}{N_0}\right) \longrightarrow t = -\frac{1}{\lambda}\ln\left(\frac{\text{Rate}_t}{\text{Rate}_0}\right) \tag{14.3.8}$$

where the subscript 0 represents the time when the plants were cut to make the paper, and the subscript *t* represents the current time.

The decay constant can be determined from the half-life of C-14, 5730 years:

$$\lambda = \frac{\ln 2}{t_{1/2}} = \frac{0.693}{5730\ \text{y}} = 1.21 \times 10^{-4}\ \text{y}^{-1} \tag{14.3.9}$$

Substituting and solving, we have:

$$t = -\frac{1}{\lambda}\ln\left(\frac{\text{Rate}_t}{\text{Rate}_0}\right) = -\frac{1}{1.21 \times 10^{-4}\ \text{y}^{-1}}\ln\left(\frac{10.8\ \text{dis/min/g C}}{13.6\ \text{dis/min/g C}}\right) = 1910\ \text{y} \tag{14.3.10}$$

Therefore, the Dead Sea Scrolls are approximately 1900 years old (Figure 14.3.8).

Figure 14.3.8: Carbon-14 dating has shown that these pages from the Dead Sea Scrolls were written or copied on paper made from plants that died between 100 BC and AD 50.

Exercise 14.3.2

More accurate dates of the reigns of ancient Egyptian pharaohs have been determined recently using plants that were preserved in their tombs. Samples of seeds and plant matter from King Tutankhamun's tomb have a C-14 decay rate of 9.07 disintegrations/min/g of C. How long ago did King Tut's reign come to an end?

Answer

about 3350 years ago, or approximately 1340 BC

There have been some significant, well-documented changes to the $^{14}_{6}\text{C}:\ ^{12}_{6}\text{C}$ ratio. The accuracy of a straightforward application of this technique depends on the $^{14}_{6}\text{C}:\ ^{12}_{6}\text{C}$ ratio in a living plant being the same now as it was in an earlier era, but this is not always valid. Due to the increasing accumulation of CO_2 molecules (largely $^{12}_{6}\text{CO}_2$) in the atmosphere caused by combustion of fossil fuels (in which essentially all of the $^{14}_{6}\text{C}$ has decayed), the ratio of $^{14}_{6}\text{C}:\ ^{12}_{6}\text{C}$ in the atmosphere may be changing. This manmade increase in $^{12}_{6}\text{CO}_2$ in the atmosphere causes the $^{14}_{6}\text{C}:\ ^{12}_{6}\text{C}$ ratio to decrease, and this in turn affects the ratio in currently living organisms on the earth. Fortunately, however, we can use other data, such as tree dating via examination of annual growth rings, to calculate correction factors. With these correction factors, accurate dates can be determined. In general, radioactive dating only works for about 10 half-lives; therefore, the limit for carbon-14 dating is about 57,000 years.

Radioactive Dating Using Nuclides Other than Carbon-14

Radioactive dating can also use other radioactive nuclides with longer half-lives to date older events. For example, uranium-238 (which decays in a series of steps into lead-206) can be used for establishing the age of rocks (and the approximate age of the oldest

rocks on earth). Since U-238 has a half-life of 4.5 billion years, it takes that amount of time for half of the original U-238 to decay into Pb-206. In a sample of rock that does not contain appreciable amounts of Pb-208, the most abundant isotope of lead, we can assume that lead was not present when the rock was formed. Therefore, by measuring and analyzing the ratio of U-238:Pb-206, we can determine the age of the rock. This assumes that all of the lead-206 present came from the decay of uranium-238. If there is additional lead-206 present, which is indicated by the presence of other lead isotopes in the sample, it is necessary to make an adjustment. Potassium-argon dating uses a similar method. K-40 decays by positron emission and electron capture to form Ar-40 with a half-life of 1.25 billion years. If a rock sample is crushed and the amount of Ar-40 gas that escapes is measured, determination of the Ar-40:K-40 ratio yields the age of the rock. Other methods, such as rubidium-strontium dating (Rb-87 decays into Sr-87 with a half-life of 48.8 billion years), operate on the same principle. To estimate the lower limit for the earth's age, scientists determine the age of various rocks and minerals, making the assumption that the earth is older than the oldest rocks and minerals in its crust. As of 2014, the oldest known rocks on earth are the Jack Hills zircons from Australia, found by uranium-lead dating to be almost 4.4 billion years old.

Summary

Nuclei that have unstable n:p ratios undergo spontaneous radioactive decay. The most common types of radioactivity are α decay, β decay, γ emission, positron emission, and electron capture. Nuclear reactions also often involve γ rays, and some nuclei decay by electron capture. Each of these modes of decay leads to the formation of a new nucleus with a more stable n:p ratio. Some substances undergo radioactive decay series, proceeding through multiple decays before ending in a stable isotope. All nuclear decay processes follow first-order kinetics, and each radioisotope has its own characteristic half-life, the time that is required for half of its atoms to decay. Because of the large differences in stability among nuclides, there is a very wide range of half-lives of radioactive substances. Many of these substances have found useful applications in medical diagnosis and treatment, determining the age of archaeological and geological objects, and more.

Key Equations

- decay rate = λN
- $t_{1/2} = \dfrac{\ln 2}{\lambda} = \dfrac{0.693}{\lambda}$

Glossary

alpha (α) decay
loss of an alpha particle during radioactive decay

beta (β) decay
breakdown of a neutron into a proton, which remains in the nucleus, and an electron, which is emitted as a beta particle

daughter nuclide
nuclide produced by the radioactive decay of another nuclide; may be stable or may decay further

electron capture
combination of a core electron with a proton to yield a neutron within the nucleus

gamma (γ) emission
decay of an excited-state nuclide accompanied by emission of a gamma ray

half-life ($t_{1/2}$)
time required for half of the atoms in a radioactive sample to decay

parent nuclide
unstable nuclide that changes spontaneously into another (daughter) nuclide

positron emission
(also, β^+ decay) conversion of a proton into a neutron, which remains in the nucleus, and a positron, which is emitted

radioactive decay

spontaneous decay of an unstable nuclide into another nuclide

radioactive decay series

chains of successive disintegrations (radioactive decays) that ultimately lead to a stable end-product

radiocarbon dating

highly accurate means of dating objects 30,000–50,000 years old that were derived from once-living matter; achieved by calculating the ratio of $^{14}_{6}\mathrm{C}:\ ^{12}_{6}\mathrm{C}$ in the object vs. the ratio of $^{14}_{6}\mathrm{C}:\ ^{12}_{6}\mathrm{C}$ in the present-day atmosphere

radiometric dating

use of radioisotopes and their properties to date the formation of objects such as archeological artifacts, formerly living organisms, or geological formations

Contributors

- Paul Flowers (University of North Carolina - Pembroke), Klaus Theopold (University of Delaware) and Richard Langley (Stephen F. Austin State University) with contributing authors. Textbook content produced by OpenStax College is licensed under a Creative Commons Attribution License 4.0 license. Download for free at http://cnx.org/contents/85abf193-2bd...a7ac8df6@9.110).

This page titled 14.3: Radioactive Decay is shared under a CC BY license and was authored, remixed, and/or curated by OpenStax.

14.4: Transmutation and Nuclear Energy

Learning Objectives

- Describe the synthesis of transuranium nuclides
- Explain nuclear fission and fusion processes
- Relate the concepts of critical mass and nuclear chain reactions
- Summarize basic requirements for nuclear fission and fusion reactors

After the discovery of radioactivity, the field of nuclear chemistry was created and developed rapidly during the early twentieth century. A slew of new discoveries in the 1930s and 1940s, along with World War II, combined to usher in the Nuclear Age in the mid-twentieth century. Science learned how to create new substances, and certain isotopes of certain elements were found to possess the capacity to produce unprecedented amounts of energy, with the potential to cause tremendous damage during war, as well as produce enormous amounts of power for society's needs during peace.

Synthesis of Nuclides

Nuclear transmutation is the conversion of one nuclide into another. It can occur by the radioactive decay of a nucleus, or the reaction of a nucleus with another particle. The first manmade nucleus was produced in Ernest Rutherford's laboratory in 1919 by a transmutation reaction, the bombardment of one type of nuclei with other nuclei or with neutrons. Rutherford bombarded nitrogen atoms with high-speed α particles from a natural radioactive isotope of radium and observed protons resulting from the reaction:

$$^{14}_{7}\text{N} + {}^{4}_{2}\text{He} \longrightarrow {}^{17}_{8}\text{O} + {}^{1}_{1}\text{H}$$

The $^{17}_{8}\text{O}$ and $^{1}_{1}\text{H}$ nuclei that are produced are stable, so no further (nuclear) changes occur.

To reach the kinetic energies necessary to produce transmutation reactions, devices called particle accelerators are used. These devices use magnetic and electric fields to increase the speeds of nuclear particles. In all accelerators, the particles move in a vacuum to avoid collisions with gas molecules. When neutrons are required for transmutation reactions, they are usually obtained from radioactive decay reactions or from various nuclear reactions occurring in nuclear reactors. The Chemistry in Everyday Life feature that follows discusses a famous particle accelerator that made worldwide news.

CERN Particle Accelerator

Located near Geneva, the CERN ("Conseil Européen pour la Recherche Nucléaire," or European Council for Nuclear Research) Laboratory is the world's premier center for the investigations of the fundamental particles that make up matter. It contains the 27-kilometer (17 mile) long, circular Large Hadron Collider (LHC), the largest particle accelerator in the world (Figure **14.4.1**). In the LHC, particles are boosted to high energies and are then made to collide with each other or with stationary targets at nearly the speed of light. Superconducting electromagnets are used to produce a strong magnetic field that guides the particles around the ring. Specialized, purpose-built detectors observe and record the results of these collisions, which are then analyzed by CERN scientists using powerful computers.

Figure **14.4.1**: A small section of the LHC is shown with workers traveling along it. (credit: Christophe Delaere)

In 2012, CERN announced that experiments at the LHC showed the first observations of the Higgs boson, an elementary particle that helps explain the origin of mass in fundamental particles. This long-anticipated discovery made worldwide news and resulted in the awarding of the 2103 Nobel Prize in Physics to François Englert and Peter Higgs, who had predicted the existence of this particle almost 50 years previously.

Prior to 1940, the heaviest-known element was uranium, whose atomic number is 92. Now, many artificial elements have been synthesized and isolated, including several on such a large scale that they have had a profound effect on society. One of these—element 93, neptunium (Np)—was first made in 1940 by McMillan and Abelson by bombarding uranium-238 with neutrons. The reaction creates unstable uranium-239, with a half-life of 23.5 minutes, which then decays into neptunium-239. Neptunium-239 is also radioactive, with a half-life of 2.36 days, and it decays into plutonium-239. The nuclear reactions are:

$$^{238}_{92}\text{U} + {}^{1}_{0}\text{n} \longrightarrow {}^{239}_{92}\text{U}$$

$$^{239}_{92}\text{U} \longrightarrow {}^{239}_{93}\text{Np} + {}^{0}_{-1}\text{e} \quad t_{\frac{1}{2}} \quad \textbf{half-life} = 23.5\ \textbf{min}$$

$$^{239}_{93}\text{Np} \longrightarrow {}^{239}_{94}\text{Pu} + {}^{0}_{-1}\text{e} \quad t_{\frac{1}{2}} \quad \textbf{half-life} = 2.36\ \textbf{days}$$

Plutonium is now mostly formed in nuclear reactors as a byproduct during the decay of uranium. Some of the neutrons that are released during U-235 decay combine with U-238 nuclei to form uranium-239; this undergoes β decay to form neptunium-239, which in turn undergoes β decay to form plutonium-239 as illustrated in the preceding three equations. It is possible to summarize these equations as:

$$^{238}_{92}\text{U} + {}^{1}_{0}\text{n} \longrightarrow {}^{239}_{92}\text{U} \xrightarrow{\beta^-} {}^{239}_{93}\text{Np} \xrightarrow{\beta^-} {}^{239}_{94}\text{Pu}$$

Heavier isotopes of plutonium—Pu-240, Pu-241, and Pu-242—are also produced when lighter plutonium nuclei capture neutrons. Some of this highly radioactive plutonium is used to produce military weapons, and the rest presents a serious storage problem because they have half-lives from thousands to hundreds of thousands of years.

Although they have not been prepared in the same quantity as plutonium, many other synthetic nuclei have been produced. Nuclear medicine has developed from the ability to convert atoms of one type into other types of atoms. Radioactive isotopes of several dozen elements are currently used for medical applications. The radiation produced by their decay is used to image or treat various organs or portions of the body, among other uses.

The elements beyond element 92 (uranium) are called transuranium elements. As of this writing, 22 transuranium elements have been produced and officially recognized by IUPAC; several other elements have formation claims that are waiting for approval. Some of these elements are shown in Table **14.4.1**.

Table **14.4.1**: Preparation of Some of the Transuranium Elements

Name	Symbol	Atomic Number	Reaction
americium	Am	95	$^{239}_{94}\text{Pu} + {}^{1}_{0}\text{n} \longrightarrow {}^{240}_{95}\text{Am} + {}^{0}_{-1}\text{e}$
curium	Cm	96	$^{239}_{94}\text{Pu} + {}^{4}_{2}\text{He} \longrightarrow {}^{242}_{96}\text{Cm} + {}^{1}_{0}\text{n}$
californium	Cf	98	$^{242}_{96}\text{Cm} + {}^{4}_{2}\text{He} \longrightarrow {}^{245}_{98}\text{Cf} + {}^{1}_{0}\text{n}$
einsteinium	Es	99	$^{238}_{92}\text{U} + 15\,{}^{1}_{0}\text{n} \longrightarrow {}^{253}_{99}\text{Es} + 7\,{}^{0}_{-1}\text{e}$
mendelevium	Md	101	$^{253}_{99}\text{Es} + {}^{4}_{2}\text{He} \longrightarrow {}^{256}_{101}\text{Md} + {}^{1}_{0}\text{n}$
nobelium	No	102	$^{246}_{96}\text{Cm} + {}^{12}_{6}\text{C} \longrightarrow {}^{254}_{102}\text{No} + 4\,{}^{1}_{0}\text{n}$
rutherfordium	Rf	104	$^{249}_{98}\text{Cf} + {}^{12}_{6}\text{C} \longrightarrow {}^{257}_{104}\text{Rf} + 4\,{}^{1}_{0}\text{n}$
seaborgium	Sg	106	$^{206}_{82}\text{Pb} + {}^{54}_{24}\text{Cr} \longrightarrow {}^{257}_{106}\text{Sg} + 3\,{}^{1}_{0}\text{n}$ $^{249}_{98}\text{Cf} + {}^{18}_{8}\text{O} \longrightarrow {}^{263}_{106}\text{Sg} + 4\,{}^{1}_{0}\text{n}$
meitnerium	Mt	107	$^{209}_{83}\text{Bi} + {}^{58}_{26}\text{Fe} \longrightarrow {}^{266}_{109}\text{Mt} + {}^{1}_{0}\text{n}$

Nuclear Fission

Many heavier elements with smaller binding energies per nucleon can decompose into more stable elements that have intermediate mass numbers and larger binding energies per nucleon—that is, mass numbers and binding energies per nucleon that are closer to the "peak" of the binding energy graph near 56. Sometimes neutrons are also produced. This decomposition is called fission, the breaking of a large nucleus into smaller pieces. The breaking is rather random with the formation of a large number of different products. Fission usually does not occur naturally, but is induced by bombardment with neutrons. The first reported nuclear fission occurred in 1939 when three German scientists, Lise Meitner, Otto Hahn, and Fritz Strassman, bombarded uranium-235 atoms with slow-moving neutrons that split the U-238 nuclei into smaller fragments that consisted of several neutrons and elements near the middle of the periodic table. Since then, fission has been observed in many other isotopes, including most actinide isotopes that have an odd number of neutrons. A typical nuclear fission reaction is shown in Figure **14.4.2**.

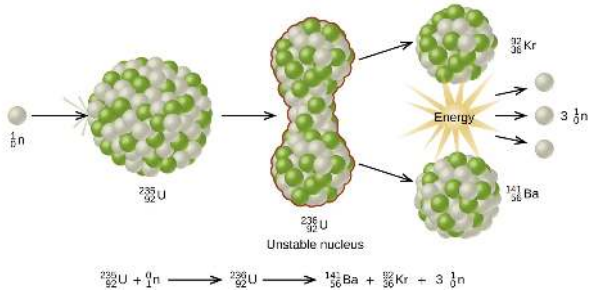

Figure **14.4.2**: When a slow neutron hits a fissionable U-235 nucleus, it is absorbed and forms an unstable U-236 nucleus. The U-236 nucleus then rapidly breaks apart into two smaller nuclei (in this case, Ba-141 and Kr-92) along with several neutrons (usually two or three), and releases a very large amount of energy.

A diagram is shown which has a white sphere labeled "superscript, 1, subscript 0, n" followed by a right-facing arrow and a large sphere composed of many smaller white and green spheres labeled "superscript, 235, subscript 92, U." The single sphere has impacted the larger sphere. A right-facing arrow leads from the larger sphere to a vertical dumbbell shaped collection of the same white and green spheres labeled "superscript, 236, subscript 92, U, Unstable nucleus." Two right-facing arrows lead from the top and bottom of this structure to two new spheres that are also composed of green and white spheres and are slightly smaller than the others. The top sphere is labeled "superscript, 92, subscript 36, K r" while the lower one is labeled "superscript, 141, subscript 56, B a." A starburst pattern labeled "Energy" lies between these two spheres and has three right-facing arrows leading from it to three white spheres labeled "3, superscript, 1, subscript 0, n." A balanced nuclear equation is written below the diagram and says "superscript, 235, subscript 92, U, plus sign, superscript, 1, subscript 0, n, yield arrow, superscript, 236, subscript 92, U, yield arrow, superscript, 141, subscript 56, B a, plus sign, superscript, 92, subscript 36, K r, plus sign, 3, superscript, 1, subscript 0, n."

Among the products of Meitner, Hahn, and Strassman's fission reaction were barium, krypton, lanthanum, and cerium, all of which have nuclei that are more stable than uranium-235. Since then, hundreds of different isotopes have been observed among the products of fissionable substances. A few of the many reactions that occur for U-235, and a graph showing the distribution of its fission products and their yields, are shown in Figure **14.4.3**. Similar fission reactions have been observed with other uranium isotopes, as well as with a variety of other isotopes such as those of plutonium.

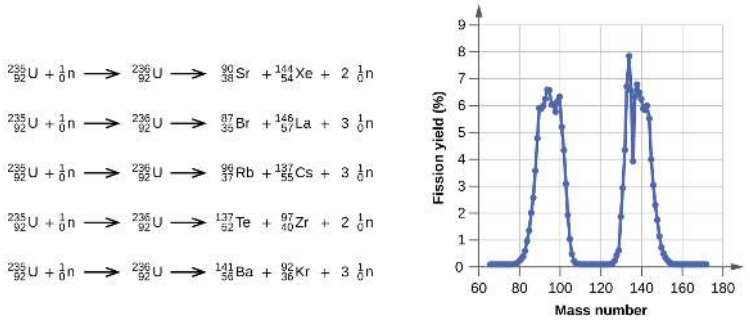

Figure **14.4.3**: (a) Nuclear fission of U-235 produces a range of fission products. (b) The larger fission products of U-235 are typically one isotope with a mass number around 85–105, and another isotope with a mass number that is about 50% larger, that is, about 130–150.

Five nuclear equations and a graph are shown. The first equation is "superscript, 235, subscript 92, U, plus sign, superscript, 1, subscript 0, n, yield arrow, superscript, 236, subscript 92, U, yield arrow, superscript, 90, subscript 38, S r, plus sign, superscript, 144, subscript 54, X e, plus sign, 2, superscript, 1, subscript 0, n." The second equation is "superscript, 235, subscript 92, U, plus sign, superscript, 1, subscript 0, n, yield arrow, superscript, 236, subscript 92, U, yield arrow, superscript, 87, subscript 35, B r, plus sign, superscript, 146, subscript 57, L a, plus sign, 3, superscript, 1, subscript 0, n." The third equation is "superscript, 235, subscript 92, U, plus sign, superscript, 1, subscript 0, n, yield arrow, superscript, 236, subscript 92, U, yield arrow, superscript, 97, subscript 37, R b, plus sign, superscript, 137, subscript 55, C s, plus sign, 3, superscript, 1, subscript 0, n." The fourth equation is "superscript, 235, subscript 92, U, plus sign, superscript, 1, subscript 0, n, yield arrow, superscript, 236, subscript 92, U, yield arrow, superscript, 137, subscript 52, T e, plus sign, superscript, 97, subscript 40, Z r, plus sign, 2, superscript, 1, subscript 0, n." The fifth equation is "superscript, 235, subscript 92, U, plus sign, superscript, 1, subscript 0, n, yield arrow, superscript, 236, subscript 92, U, yield arrow, superscript, 141, subscript 56, B a, plus sign, superscript, 92, subscript 36, K r, plus sign, 3, superscript, 1, subscript 0, n." A graph is also shown where the y-axis is labeled "Fission yield, open parenthesis, percent sign, close parenthesis" and has values of 0 to 9 in increments of 1 while the x-axis is labeled "Mass number" and has values of 60 to 180 in increments of 20. The graph begins near point "65, 0" and rises rapidly to near "92, 6.6," then drops just as rapidly to "107, 0" and remains there to point "127, 0." The graph then rises again to near "132, 8," then goes up and down a bit before falling to a point "153, 0," and going horizontal.

A tremendous amount of energy is produced by the fission of heavy elements. For instance, when one mole of U-235 undergoes fission, the products weigh about 0.2 grams less than the reactants; this "lost" mass is converted into a very large amount of energy, about 1.8×10^{10} kJ per mole of U-235. Nuclear fission reactions produce incredibly large amounts of energy compared to chemical

reactions. The fission of 1 kilogram of uranium-235, for example, produces about 2.5 million times as much energy as is produced by burning 1 kilogram of coal.

As described earlier, when undergoing fission U-235 produces two “medium-sized” nuclei, and two or three neutrons. These neutrons may then cause the fission of other uranium-235 atoms, which in turn provide more neutrons that can cause fission of even more nuclei, and so on. If this occurs, we have a nuclear chain reaction (Figure **14.4.4**). On the other hand, if too many neutrons escape the bulk material without interacting with a nucleus, then no chain reaction will occur.

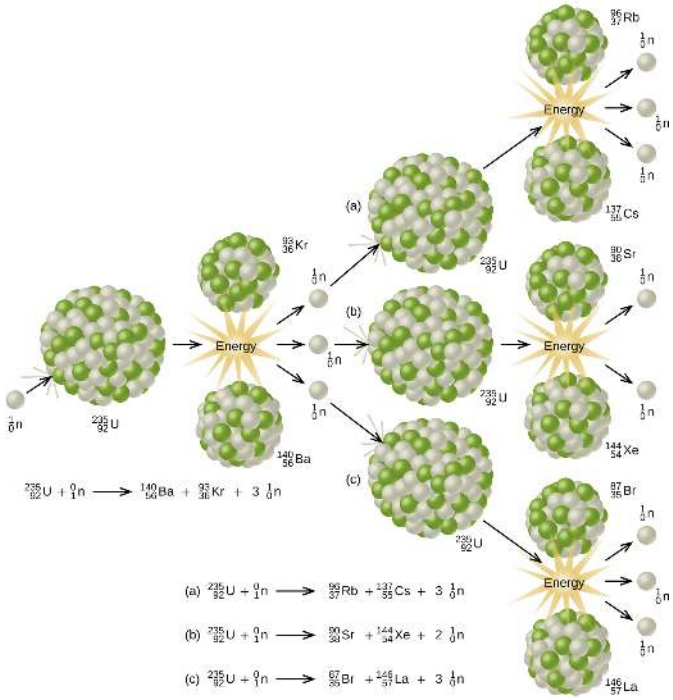

Figure **14.4.4**: The fission of a large nucleus, such as U-235, produces two or three neutrons, each of which is capable of causing fission of another nucleus by the reactions shown. If this process continues, a nuclear chain reaction occurs.

A diagram is shown which has a white sphere labeled “superscript, 1, subscript 0, n” followed by a right-facing arrow and a large sphere composed of many smaller white and green spheres labeled “superscript, 235, subscript 92, U.” The single sphere has impacted the larger sphere. A right-facing arrow leads from the larger sphere to a pair of smaller spheres which are collections of the same white and green spheres. The upper of these two images is labeled “superscript, 93, subscript 36, K r” while the lower of the two is labeled “superscript, 142, subscript 56, B a.” A starburst pattern labeled “Energy” lies between these two spheres and has three right-facing arrows leading from it to three white spheres labeled “ superscript, 1, subscript 0, n.” An equation below this portion of the diagram reads ““superscript, 235, subscript 92, U, plus sign, superscript, 1, subscript 0, n, yield arrow, superscript, 140, subscript 56, B a, plus sign, superscript 90, subscript 36, K r, plus sign, 3, superscript 1, subscript 0, n.” A right-facing arrow leads from each of these white spheres to three larger spheres, each composed of many smaller green and white spheres and labeled, from top to bottom as “a, superscript,235, subscript 92, U,” “b, superscript,235, subscript 92, U” and “c, superscript,235, subscript 92, U.” Each of these spheres is followed by a right-facing arrow which points to a pair of smaller spheres composed of the same green and white spheres with starburst patterns in between each pair labeled “Energy.” The spheres of the top pair are labeled, from top to bottom, “superscript, 96, subscript 37, R b” and “superscript, 137, subscript 55, C s.” The spheres of the middle pair are labeled, from top to bottom, “superscript, 90, subscript 38, S r” and “superscript, 144, subscript 54, X e.” The spheres of the bottom pair are labeled, from top to bottom, “superscript, 87, subscript 35, B r” and “superscript, 146, subscript 57, L a.” Each pair of spheres is followed by three right-facing arrows leading to three white spheres labeled “superscript, 1, subscript 0, n.” Below the diagram are three nuclear equations. Equation a reads “superscript, 235, subscript 92, U, plus sign, superscript, 1, subscript 0, n, yield arrow, superscript, 96, subscript 37, R b, plus sign, superscript 137, subscript 55, C s, plus sign, 3, superscript 1, subscript 0, n.” Equation b reads “superscript, 235, subscript 92, U, plus sign, superscript, 1, subscript 0, n, yield arrow, superscript, 90, subscript 38, S r, plus sign, superscript144, subscript 54, X e, plus sign, 2, superscript 1, subscript 0, n.” Equation c reads “superscript, 235, subscript 92, U, plus sign, superscript, 1, subscript 0, n, yield arrow, superscript, 87, subscript 35, B r, plus sign, superscript 146, subscript 57, L a, plus sign, 3, superscript 1, subscript 0, n”

Material that can sustain a nuclear fission chain reaction is said to be fissile or fissionable. (Technically, fissile material can undergo fission with neutrons of any energy, whereas fissionable material requires high-energy neutrons.) Nuclear fission becomes self-sustaining when the number of neutrons produced by fission equals or exceeds the number of neutrons absorbed by splitting nuclei plus the number that escape into the surroundings. The amount of a fissionable material that will support a self-sustaining chain reaction is a critical mass. An amount of fissionable material that cannot sustain a chain reaction is a subcritical mass. An amount of material in which there is an increasing rate of fission is known as a supercritical mass. The critical mass depends on the type of material: its purity, the temperature, the shape of the sample, and how the neutron reactions are controlled (Figure **14.4.5**).

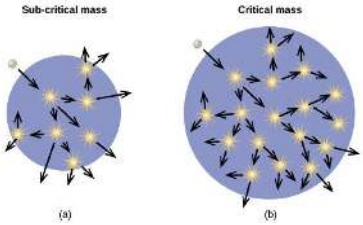

Figure **14.4.5**: (a) In a subcritical mass, the fissile material is too small and allows too many neutrons to escape the material, so a chain reaction does not occur. (b) In a critical mass, a large enough number of neutrons in the fissile material induce fission to create a chain reaction.

The images are shown and labeled “a,” “b” and “c.” Image a, labeled “Sub-critical mass,” shows a blue circle background with a white sphere near the outer, top, left edge of the circle. A downward, right-facing arrow indicates that the white sphere enters the circle. Seven small, yellow starbursts are drawn in the blue circle and each has an arrow facing from it to outside the circle, in seemingly random directions. Image b, labeled “Critical mass,” shows a blue circle background with a white sphere near the outer, top, left edge of the circle. A downward, right-facing arrow indicates that the white sphere enters the circle. Seventeen small, yellow starbursts are drawn in the blue circle and each has an arrow facing from it to outside the circle, in seemingly random directions. Image c, labeled “Critical mass from neutron deflection,” shows a blue circle background, lying in a larger purple circle, with a white sphere near the outer, top, left edge of the purple circle. A downward, right-facing arrow indicates that the white sphere enters both of the circles. Thirteen small, yellow starbursts are drawn in the blue circle and each has an arrow facing from it to outside the blue circle, and a couple outside of the purple circle, in seemingly random directions.

An atomic bomb (Figure **14.4.6**) contains several pounds of fissionable material, $^{235}_{92}\mathbf{U}$ or $^{239}_{94}\mathbf{Pu}$, a source of neutrons, and an explosive device for compressing it quickly into a small volume. When fissionable material is in small pieces, the proportion of neutrons that escape through the relatively large surface area is great, and a chain reaction does not take place. When the small pieces of fissionable material are brought together quickly to form a body with a mass larger than the critical mass, the relative number of escaping neutrons decreases, and a chain reaction and explosion result.

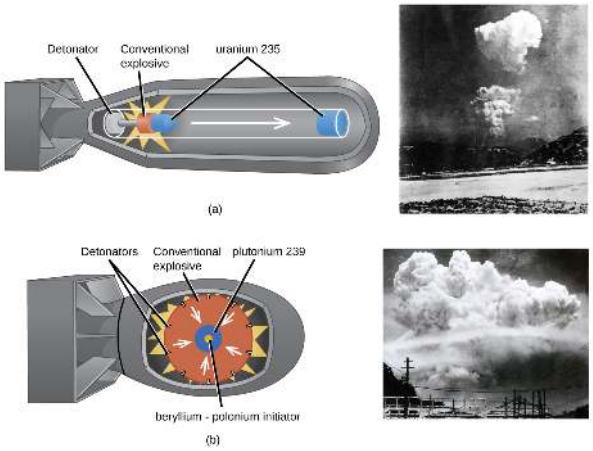

Figure **14.4.6**: (a) The nuclear fission bomb that destroyed Hiroshima on August 6, 1945, consisted of two subcritical masses of U-235, where conventional explosives were used to fire one of the subcritical masses into the other, creating the critical mass for the nuclear explosion. (b) The plutonium bomb that destroyed Nagasaki on August 12, 1945, consisted of a hollow sphere of plutonium that was rapidly compressed by conventional explosives. This led to a concentration of plutonium in the center that was greater than the critical mass necessary for the nuclear explosion.

Two diagrams are shown, each to the left of a photo, and labeled “a” and “b.” Diagram a shows the outer casing of a bomb that has a long, tubular shape with a squared-off tail. Components in the shell show a tube with a white disk labeled “Detonator” on the left, an orange disk with a bright yellow starburst drawn around it labeled “Conventional explosive” in the middle and a right-facing arrow leading to a blue disk in the nose of the bomb labeled “uranium 235.” A small blue cone next to the orange disk is shares the label of “uranium 235.” A black and white photo next to this diagram shows a far-off shot of a rising cloud over a landscape. Diagram b shows the outer casing of a bomb that has a short, rounded shape with a squared-off tail. Components in the shell show a large orange circle labeled “Conventional explosive” with a series of black dots around its edge, labeled “Detonators,” and a yellow starburst behind it. White arrows face from the outer edge of the orange circle to a blue circle in the center with a yellow core. The blue circle is labeled “plutonium 239” while the yellow core is labeled “beryllium, dash, polonium initiator.” A black and white photo next to this diagram shows a far-off shot of a giant rising cloud over a landscape.

Fission Reactors

Chain reactions of fissionable materials can be controlled and sustained without an explosion in a nuclear reactor (Figure **14.4.7**). Any nuclear reactor that produces power via the fission of uranium or plutonium by bombardment with neutrons must have at least five components: nuclear fuel consisting of fissionable material, a nuclear moderator, reactor coolant, control rods, and a shield and containment system. We will discuss these components in greater detail later in the section. The reactor works by separating the fissionable nuclear material such that a critical mass cannot be formed, controlling both the flux and absorption of neutrons to allow shutting down the fission reactions. In a nuclear reactor used for the production of electricity, the energy released by fission reactions is trapped as thermal energy and used to boil water and produce steam. The steam is used to turn a turbine, which powers a generator for the production of electricity.

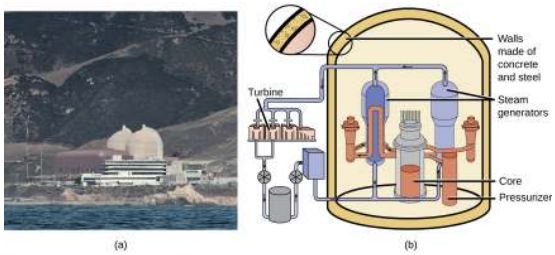

Figure **14.4.7**: (a) The Diablo Canyon Nuclear Power Plant near San Luis Obispo is the only nuclear power plant currently in operation in California. The domes are the containment structures for the nuclear reactors, and the brown building houses the turbine where electricity is generated. Ocean water is used for cooling. (b) The Diablo Canyon uses a pressurized water reactor, one of a few different fission reactor designs in use around the world, to produce electricity. Energy from the nuclear fission reactions in the core heats water in a closed, pressurized system. Heat from this system produces steam that drives a turbine, which in turn produces electricity. (credit a: modification of work by “Mike” Michael L. Baird; credit b: modification of work by the Nuclear Regulatory Commission)

A photo labeled “a” and a diagram labeled “b” is shown. The photo is of a power plant with two large white domes and many buildings. The diagram shows a cylindrical container with thick walls labeled “Walls made of concrete and steel” and three main components inside. The first of these components is a pair of tall cylinders labeled “Steam generators” that sit to either side of a shorter cylinder labeled “Core.” Next to the core is a thin cylinder labeled “Pressurizer.” To the left of the outer walls is a set of pistons labeled “Turbines” that sit above a series of other equipment.

Nuclear Fuels

Nuclear fuel consists of a fissionable isotope, such as uranium-235, which must be present in sufficient quantity to provide a self-sustaining chain reaction. In the United States, uranium ores contain from 0.05–0.3% of the uranium oxide U_3O_8; the uranium in the ore is about 99.3% nonfissionable U-238 with only 0.7% fissionable U-235. Nuclear reactors require a fuel with a higher concentration of U-235 than is found in nature; it is normally enriched to have about 5% of uranium mass as U-235. At this concentration, it is not possible to achieve the supercritical mass necessary for a nuclear explosion. Uranium can be enriched by gaseous diffusion (the only method currently used in the US), using a gas centrifuge, or by laser separation.

In the gaseous diffusion enrichment plant where U-235 fuel is prepared, UF_6 (uranium hexafluoride) gas at low pressure moves through barriers that have holes just barely large enough for UF_6 to pass through. The slightly lighter $^{235}UF_6$ molecules diffuse through the barrier slightly faster than the heavier $^{238}UF_6$ molecules. This process is repeated through hundreds of barriers, gradually increasing the concentration of $^{235}UF_6$ to the level needed by the nuclear reactor. The basis for this process, Graham’s law, is described in the chapter on gases. The enriched UF_6 gas is collected, cooled until it solidifies, and then taken to a fabrication facility where it is made into fuel assemblies. Each fuel assembly consists of fuel rods that contain many thimble-sized, ceramic-encased, enriched uranium (usually UO_2) fuel pellets. Modern nuclear reactors may contain as many as 10 million fuel pellets. The amount of energy in each of these pellets is equal to that in almost a ton of coal or 150 gallons of oil.

Nuclear Moderators

Neutrons produced by nuclear reactions move too fast to cause fission (Figure 21.5.5). They must first be slowed to be absorbed by the fuel and produce additional nuclear reactions. A nuclear moderator is a substance that slows the neutrons to a speed that is low enough to cause fission. Early reactors used high-purity graphite as a moderator. Modern reactors in the US exclusively use heavy water ($^2_1H_2O$) or light water (ordinary H_2O), whereas some reactors in other countries use other materials, such as carbon dioxide, beryllium, or graphite.

Reactor Coolants

A nuclear reactor coolant is used to carry the heat produced by the fission reaction to an external boiler and turbine, where it is transformed into electricity. Two overlapping coolant loops are often used; this counteracts the transfer of radioactivity from the reactor to the primary coolant loop. All nuclear power plants in the US use water as a coolant. Other coolants include molten sodium, lead, a lead-bismuth mixture, or molten salts.

Control Rods

Nuclear reactors use control rods (Figure **14.4.8**) to control the fission rate of the nuclear fuel by adjusting the number of slow neutrons present to keep the rate of the chain reaction at a safe level. Control rods are made of boron, cadmium, hafnium, or other elements that are able to absorb neutrons. Boron-10, for example, absorbs neutrons by a reaction that produces lithium-7 and alpha particles:

$$^{10}_{5}\mathrm{B} + {}^{1}_{0}\mathrm{n} \longrightarrow {}^{7}_{3}\mathrm{Li} + {}^{4}_{2}\mathrm{He}$$

When control rod assemblies are inserted into the fuel element in the reactor core, they absorb a larger fraction of the slow neutrons, thereby slowing the rate of the fission reaction and decreasing the power produced. Conversely, if the control rods are removed, fewer neutrons are absorbed, and the fission rate and energy production increase. In an emergency, the chain reaction can be shut down by fully inserting all of the control rods into the nuclear core between the fuel rods.

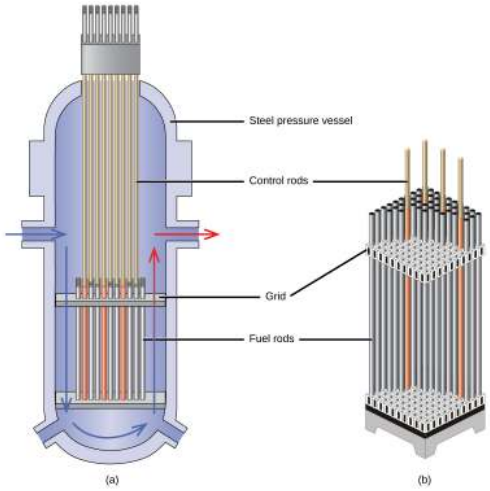

Figure **14.4.8**: The nuclear reactor core shown in (a) contains the fuel and control rod assembly shown in (b). (credit: modification of work by E. Generalic, glossary.periodni.com/glossar...en=control+rod)

Two diagrams are shown and labeled “a” and “b.” Diagram a shows a cut-away view of a vertical tube with a flat, horizontal plate near the bottom that connects to a series of vertical pipes lined up next to one another and labeled “Fuel rods.” A second horizontal plate labeled “Grid” lies at the top of the pipes and a second set of thinner, vertical pipes, labeled “Control rods,” leads from this plate to the top of the container. The walls of the container are labeled “Steel pressure vessel.” A blue, right-facing arrow leads from an entry point in the left side of the container and is followed by a second, down-facing blue arrow and a curved, right-facing arrow that trace along the outer, bottom edge of the container. A blue and red arrow follows these and faces up the right side of the container to an exit near the right face where a red, right-facing arrow leads out. Diagram b is a cut-away image of a vertical, rectangular, three dimensional set of vertical pipes. The pipes are labeled “Fuel rods” and are inserted into an upper and lower horizontal plate labeled “Grid.” Four thin rods extend above the pipes and are labeled “Control rods.

Shield and Containment System

During its operation, a nuclear reactor produces neutrons and other radiation. Even when shut down, the decay products are radioactive. In addition, an operating reactor is thermally very hot, and high pressures result from the circulation of water or another coolant through it. Thus, a reactor must withstand high temperatures and pressures, and must protect operating personnel from the radiation. Reactors are equipped with a containment system (or shield) that consists of three parts:

1. The reactor vessel, a steel shell that is 3–20-centimeters thick and, with the moderator, absorbs much of the radiation produced by the reactor
2. A main shield of 1–3 meters of high-density concrete
3. A personnel shield of lighter materials that protects operators from γ rays and X-rays

In addition, reactors are often covered with a steel or concrete dome that is designed to contain any radioactive materials might be released by a reactor accident.

Video **14.4.1**: Click here to watch a 3-minute video from the Nuclear Energy Institute on how nuclear reactors work.

Nuclear power plants are designed in such a way that they cannot form a supercritical mass of fissionable material and therefore cannot create a nuclear explosion. But as history has shown, failures of systems and safeguards can cause catastrophic accidents, including chemical explosions and nuclear meltdowns (damage to the reactor core from overheating). The following Chemistry in Everyday Life feature explores three infamous meltdown incidents.

The importance of cooling and containment are amply illustrated by three major accidents that occurred with the nuclear reactors at nuclear power generating stations in the United States (Three Mile Island), the former Soviet Union (Chernobyl), and Japan (Fukushima).

In March 1979, the cooling system of the Unit 2 reactor at Three Mile Island Nuclear Generating Station in Pennsylvania failed, and the cooling water spilled from the reactor onto the floor of the containment building. After the pumps stopped, the reactors overheated due to the high radioactive decay heat produced in the first few days after the nuclear reactor shut down. The temperature of the core climbed to at least 2200 °C, and the upper portion of the core began to melt. In addition, the zirconium alloy cladding of the fuel rods began to react with steam and produced hydrogen:

$$\mathrm{Zr}(s) + 2\,\mathrm{H_2O}(g) \longrightarrow \mathrm{ZrO_2}(s) + 2\,\mathrm{H_2}(g)$$

The hydrogen accumulated in the confinement building, and it was feared that there was danger of an explosion of the mixture of hydrogen and air in the building. Consequently, hydrogen gas and radioactive gases (primarily krypton and xenon) were vented from the building. Within a week, cooling water circulation was restored and the core began to cool. The plant was closed for nearly 10 years during the cleanup process.

Although zero discharge of radioactive material is desirable, the discharge of radioactive krypton and xenon, such as occurred at the Three Mile Island plant, is among the most tolerable. These gases readily disperse in the atmosphere and thus do not produce highly radioactive areas. Moreover, they are noble gases and are not incorporated into plant and animal matter in the food chain. Effectively none of the heavy elements of the core of the reactor were released into the environment, and no cleanup of the area outside of the containment building was necessary (Figure **14.4.9**).



Figure **14.4.9**: (a) In this 2010 photo of Three Mile Island, the remaining structures from the damaged Unit 2 reactor are seen on the left, whereas the separate Unit 1 reactor, unaffected by the accident, continues generating power to this day (right). (b) President Jimmy Carter visited the Unit 2 control room a few days after the accident in 1979.

Two photos, labeled “a” and “b” are shown. Photo a is an aerial view of a nuclear power plant. Photo b shows a small group of men walking through a room filled with electronics.

Another major nuclear accident involving a reactor occurred in April 1986, at the Chernobyl Nuclear Power Plant in Ukraine, which was still a part of the former Soviet Union. While operating at low power during an unauthorized experiment with some of its safety devices shut off, one of the reactors at the plant became unstable. Its chain reaction became uncontrollable and increased to a level far beyond what the reactor was designed for. The steam pressure in the reactor rose to between 100 and 500 times the full power pressure and ruptured the reactor. Because the reactor was not enclosed in a containment building, a large amount of radioactive material spewed out, and additional fission products were released, as the graphite (carbon) moderator of the core ignited and burned. The fire was controlled, but over 200 plant workers and firefighters developed acute radiation sickness and at least 32 soon died from the effects of the radiation. It is predicted that about 4000 more deaths will occur among emergency workers and former Chernobyl residents from radiation-induced cancer and leukemia. The reactor has since been encapsulated in steel and concrete, a now-decaying structure known as the sarcophagus. Almost 30 years later, significant radiation problems still persist in the area, and Chernobyl largely remains a wasteland.

In 2011, the Fukushima Daiichi Nuclear Power Plant in Japan was badly damaged by a 9.0-magnitude earthquake and resulting tsunami. Three reactors up and running at the time were shut down automatically, and emergency generators came online to power electronics and coolant systems. However, the tsunami quickly flooded the emergency generators and cut power to the pumps that circulated coolant water through the reactors. High-temperature steam in the reactors reacted with zirconium alloy to produce hydrogen gas. The gas escaped into the containment building, and the mixture of hydrogen and air exploded. Radioactive material was released from the containment vessels as the result of deliberate venting to reduce the hydrogen pressure, deliberate discharge of coolant water into the sea, and accidental or uncontrolled events.

An evacuation zone around the damaged plant extended over 12.4 miles away, and an estimated 200,000 people were evacuated from the area. All 48 of Japan’s nuclear power plants were subsequently shut down, remaining shuttered as of December 2014. Since the disaster, public opinion has shifted from largely favoring to largely opposing increasing the use of nuclear power plants, and a restart of Japan’s atomic energy program is still stalled (Figure **14.4.10**).

Figure **14.4.10**: (a) After the accident, contaminated waste had to be removed, and (b) an evacuation zone was set up around the plant in areas that received heavy doses of radioactive fallout. (credit a: modification of work by “Live Action Hero”/Flickr)

A photo and a map, labeled “a” and “b,” respectively, are shown. Photo a shows a man in a body-covering safety suit working near a series of blue, plastic coated containers. Map b shows a section of land with the ocean on each side. Near the upper right side of the land is a small red dot, labeled “greater than, 12.5, m R backslash, h r,” that is surrounded by a zone of orange that extends in the upper left direction labeled “2.17, dash, 12.5, m R backslash, h r.” The orange is surrounded by an outline of yellow labeled “1.19, dash, 2.17, m R backslash, h r” and a wider outline of green labeled “0.25, dash, 1.19, m R backslash, h r.” A large area of light blue, labeled “0.03, dash, 0.25, m R backslash, h r” surrounds the green area and extends to the lower middle of the map. A large section of the lower middle and left of the land is covered by dark blue, labeled “less than 0.03, m R backslash, h r.”

The energy produced by a reactor fueled with enriched uranium results from the fission of uranium as well as from the fission of plutonium produced as the reactor operates. As discussed previously, the plutonium forms from the combination of neutrons and the uranium in the fuel. In any nuclear reactor, only about 0.1% of the mass of the fuel is converted into energy. The other 99.9% remains in the fuel rods as fission products and unused fuel. All of the fission products absorb neutrons, and after a period of several months to a few years, depending on the reactor, the

fission products must be removed by changing the fuel rods. Otherwise, the concentration of these fission products would increase and absorb more neutrons until the reactor could no longer operate.

Spent fuel rods contain a variety of products, consisting of unstable nuclei ranging in atomic number from 25 to 60, some transuranium elements, including plutonium and americium, and unreacted uranium isotopes. The unstable nuclei and the transuranium isotopes give the spent fuel a dangerously high level of radioactivity. The long-lived isotopes require thousands of years to decay to a safe level. The ultimate fate of the nuclear reactor as a significant source of energy in the United States probably rests on whether or not a politically and scientifically satisfactory technique for processing and storing the components of spent fuel rods can be developed.

Nuclear Fusion and Fusion Reactors

The process of converting very light nuclei into heavier nuclei is also accompanied by the conversion of mass into large amounts of energy, a process called fusion. The principal source of energy in the sun is a net fusion reaction in which four hydrogen nuclei fuse and produce one helium nucleus and two positrons. This is a net reaction of a more complicated series of events:

$$4{}_1^1\mathrm{H} \longrightarrow {}_2^4\mathrm{He} + 2{}_{+1}^0$$

A helium nucleus has a mass that is 0.7% less than that of four hydrogen nuclei; this lost mass is converted into energy during the fusion. This reaction produces about 3.6×10^{11} kJ of energy per mole of $_2^4\mathrm{He}$ produced. This is somewhat larger than the energy produced by the nuclear fission of one mole of U-235 (1.8×10^{10} kJ), and over 3 million times larger than the energy produced by the (chemical) combustion of one mole of octane (5471 kJ).

It has been determined that the nuclei of the heavy isotopes of hydrogen, a deuteron, $_1^2$ and a triton, $_1^3$, undergo fusion at extremely high temperatures (thermonuclear fusion). They form a helium nucleus and a neutron:

$${}_1^2\mathrm{H} + {}_1^3\mathrm{H} \longrightarrow {}_2^4\mathrm{He} + 2{}_0^1\mathrm{n}$$

This change proceeds with a mass loss of 0.0188 amu, corresponding to the release of 1.69×10^9 kilojoules per mole of $_2^4\mathrm{He}$ formed. The very high temperature is necessary to give the nuclei enough kinetic energy to overcome the very strong repulsive forces resulting from the positive charges on their nuclei so they can collide.

Useful fusion reactions require very high temperatures for their initiation—about 15,000,000 K or more. At these temperatures, all molecules dissociate into atoms, and the atoms ionize, forming plasma. These conditions occur in an extremely large number of locations throughout the universe—stars are powered by fusion. Humans have already figured out how to create temperatures high enough to achieve fusion on a large scale in thermonuclear weapons. A thermonuclear weapon such as a hydrogen bomb contains a nuclear fission bomb that, when exploded, gives off enough energy to produce the extremely high temperatures necessary for fusion to occur.

Another much more beneficial way to create fusion reactions is in a fusion reactor, a nuclear reactor in which fusion reactions of light nuclei are controlled. Because no solid materials are stable at such high temperatures, mechanical devices cannot contain the plasma in which fusion reactions occur. Two techniques to contain plasma at the density and temperature necessary for a fusion reaction are currently the focus of intensive research efforts: containment by a magnetic field and by the use of focused laser beams (Figure **14.4.11**). A number of large projects are working to attain one of the biggest goals in science: getting hydrogen fuel to ignite and produce more energy than the amount supplied to achieve the extremely high temperatures and pressures that are required for fusion. At the time of this writing, there are no self-sustaining fusion reactors operating in the world, although small-scale controlled fusion reactions have been run for very brief periods.



Figure **14.4.11**: (a) This model is of the International Thermonuclear Experimental Reactor (ITER) reactor. Currently under construction in the south of France with an expected completion date of 2027, the ITER will be the world's largest experimental Tokamak nuclear fusion reactor with a goal of achieving large-scale sustained energy production. (b) In 2012, the National Ignition Facility at Lawrence Livermore National Laboratory briefly produced over 500,000,000,000 watts (500 terawatts, or 500 TW) of peak power and delivered 1,850,000 joules (1.85 MJ) of energy, the largest laser energy ever produced and 1000 times the power usage of the entire United States in any given moment. Although lasting only a few billionths of a second, the 192 lasers attained the conditions needed for nuclear fusion ignition. This image shows the target prior to the laser shot. (credit a: modification of work by Stephan Mosel)

Two photos are shown and labeled "a" and "b." Photo a shows a model of the ITER reactor made up of colorful components. Photo b shows a close-up view of the end of a long, mechanical arm made up of many metal components.

Summary

It is possible to produce new atoms by bombarding other atoms with nuclei or high-speed particles. The products of these transmutation reactions can be stable or radioactive. A number of artificial elements, including technetium, astatine, and the transuranium elements, have been produced in this way.

Nuclear power as well as nuclear weapon detonations can be generated through fission (reactions in which a heavy nucleus is split into two or more lighter nuclei and several neutrons). Because the neutrons may induce additional fission reactions when they combine with other heavy nuclei, a chain reaction can result. Useful power is obtained if the fission process is carried out in a nuclear reactor. The conversion of light nuclei into heavier nuclei (fusion) also produces energy. At present, this energy has not been contained adequately and is too expensive to be feasible for commercial energy production.

Glossary

chain reaction
repeated fission caused when the neutrons released in fission bombard other atoms

containment system
(also, shield) a three-part structure of materials that protects the exterior of a nuclear fission reactor and operating personnel from the high temperatures, pressures, and radiation levels inside the reactor

control rod
material inserted into the fuel assembly that absorbs neutrons and can be raised or lowered to adjust the rate of a fission reaction

critical mass
amount of fissionable material that will support a self-sustaining (nuclear fission) chain reaction

fissile (or fissionable)
when a material is capable of sustaining a nuclear fission reaction

fission

splitting of a heavier nucleus into two or more lighter nuclei, usually accompanied by the conversion of mass into large amounts of energy

fusion
combination of very light nuclei into heavier nuclei, accompanied by the conversion of mass into large amounts of energy

fusion reactor
nuclear reactor in which fusion reactions of light nuclei are controlled

nuclear fuel
fissionable isotope present in sufficient quantities to provide a self-sustaining chain reaction in a nuclear reactor

nuclear moderator
substance that slows neutrons to a speed low enough to cause fission

nuclear reactor
environment that produces energy via nuclear fission in which the chain reaction is controlled and sustained without explosion

nuclear transmutation
conversion of one nuclide into another nuclide

particle accelerator
device that uses electric and magnetic fields to increase the kinetic energy of nuclei used in transmutation reactions

reactor coolant
assembly used to carry the heat produced by fission in a reactor to an external boiler and turbine where it is transformed into electricity

subcritical mass
amount of fissionable material that cannot sustain a chain reaction; less than a critical mass

supercritical mass
amount of material in which there is an increasing rate of fission

transmutation reaction
bombardment of one type of nuclei with other nuclei or neutrons

transuranium element
element with an atomic number greater than 92; these elements do not occur in nature

---

This page titled 14.4: Transmutation and Nuclear Energy is shared under a CC BY license and was authored, remixed, and/or curated by OpenStax.

- **21.4: Transmutation and Nuclear Energy** by OpenStax is licensed CC BY 4.0. Original source: https://openstax.org/details/books/chemistry-2e.

https://chem.libretexts.org/@go/page/162525

https://chem.libretexts.org/@go/page/162525

https://chem.libretexts.org/@go/page/162525

https://chem.libretexts.org/@go/page/162525

https://chem.libretexts.org/@go/page/162525

14.5: Uses of Radioisotopes

Learning Objectives

- List common applications of radioactive isotopes

Radioactive isotopes have the same chemical properties as stable isotopes of the same element, but they emit radiation, which can be detected. If we replace one (or more) atom(s) with radioisotope(s) in a compound, we can track them by monitoring their radioactive emissions. This type of compound is called a radioactive tracer (or radioactive label). Radioisotopes are used to follow the paths of biochemical reactions or to determine how a substance is distributed within an organism. Radioactive tracers are also used in many medical applications, including both diagnosis and treatment. They are used to measure engine wear, analyze the geological formation around oil wells, and much more.

Radioisotopes have revolutionized medical practice, where they are used extensively. Over 10 million nuclear medicine procedures and more than 100 million nuclear medicine tests are performed annually in the United States. Four typical examples of radioactive tracers used in medicine are technetium-99 ($^{99}_{43}\mathrm{Tc}$), thallium-201 ($^{201}_{81}\mathrm{Tl}$), iodine-131 ($^{131}_{53}\mathrm{I}$), and sodium-24 ($^{24}_{11}\mathrm{Na}$). Damaged tissues in the heart, liver, and lungs absorb certain compounds of technetium-99 preferentially. After it is injected, the location of the technetium compound, and hence the damaged tissue, can be determined by detecting the γ rays emitted by the Tc-99 isotope. Thallium-201 (Figure **14.5.1**) becomes concentrated in healthy heart tissue, so the two isotopes, Tc-99 and Tl-201, are used together to study heart tissue. Iodine-131 concentrates in the thyroid gland, the liver, and some parts of the brain. It can therefore be used to monitor goiter and treat thyroid conditions, such as Grave's disease, as well as liver and brain tumors. Salt solutions containing compounds of sodium-24 are injected into the bloodstream to help locate obstructions to the flow of blood.

Figure **14.5.1**: Administering thallium-201 to a patient and subsequently performing a stress test offer medical professionals an opportunity to visually analyze heart function and blood flow. (credit: modification of work by "Blue0ctane"/Wikimedia Commons)

A medical professional is assisting a topless elderly man on a treadmill with sensors and electrical wires connected to his torso.

Radioisotopes used in medicine typically have short half-lives—for example, the ubiquitous Tc-99m has a half-life of 6.01 hours. This makes Tc-99m essentially impossible to store and prohibitively expensive to transport, so it is made on-site instead. Hospitals and other medical facilities use Mo-99 (which is primarily extracted from U-235 fission products) to generate Tc-99. Mo-99 undergoes β decay with a half-life of 66 hours, and the Tc-99 is then chemically extracted (Figure **14.5.2**). The parent nuclide Mo-99 is part of a molybdate ion, $\mathrm{MoO_4^{2-}}$; when it decays, it forms the pertechnetate ion, $\mathrm{TcO_4^-}$. These two water-soluble ions are separated by column chromatography, with the higher charge molybdate ion adsorbing onto the alumina in the column, and the lower charge pertechnetate ion passing through the column in the solution. A few micrograms of Mo-99 can produce enough Tc-99 to perform as many as 10,000 tests.



(a) (b)

Figure **14.5.2**: (a) The first Tc-99m generator (circa 1958) is used to separate Tc-99 from Mo-99. The MoO_4^{2-} *is retained by the matrix in the column, whereas the* TcO_4^- *passes through and is collected. (b) Tc-99 was used in this scan of the neck of a patient with Grave's disease. The scan shows the location of high concentrations of Tc-99. (credit a: modification of work by the Department of Energy; credit b: modification of work by "MBq"/Wikimedia Commons)*

The first image shows a hand pouring a liquid from a measuring cylinder into a column held up by a clamp. Below the column is a glass tube. The second picture shows red dots on a dark background dispersed everywhere with four spots of heavily concentrated regions.

Radioisotopes can also be used, typically in higher doses than as a tracer, as treatment. Radiation therapy is the use of high-energy radiation to damage the DNA of cancer cells, which kills them or keeps them from dividing (Figure **14.5.3**). A cancer patient may receive external beam radiation therapy delivered by a machine outside the body, or internal radiation therapy (brachytherapy) from a radioactive substance that has been introduced into the body. Note that chemotherapy is similar to internal radiation therapy in that the cancer treatment is injected into the body, but differs in that chemotherapy uses chemical rather than radioactive substances to kill the cancer cells.

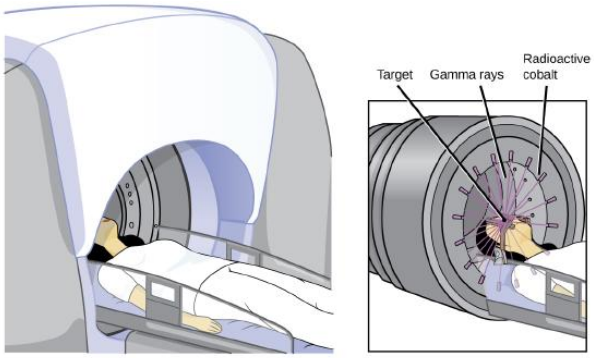

Figure **14.5.3**: The cartoon in (a) shows a cobalt-60 machine used in the treatment of cancer. The diagram in (b) shows how the gantry of the Co-60 machine swings through an arc, focusing radiation on the targeted region (tumor) and minimizing the amount of radiation that passes through nearby regions.

A. A woman lies down as she goes into a dome shaped medical machine. B. A closer view of the women's head shows gamma rays from radioactive cobalt attacks the target on the woman's head.

Cobalt-60 is a synthetic radioisotope produced by the neutron activation of Co-59, which then undergoes β decay to form Ni-60, along with the emission of γ radiation. The overall process is:

$$^{59}_{27}\text{Co} + ^{1}_{0}\text{n} \longrightarrow ^{60}_{27}\text{Co} \longrightarrow ^{60}_{28}\text{Ni} + ^{0}_{-1}\beta + 2^{0}_{0}\gamma$$

The overall decay scheme for this is shown graphically in Figure **14.5.4**.

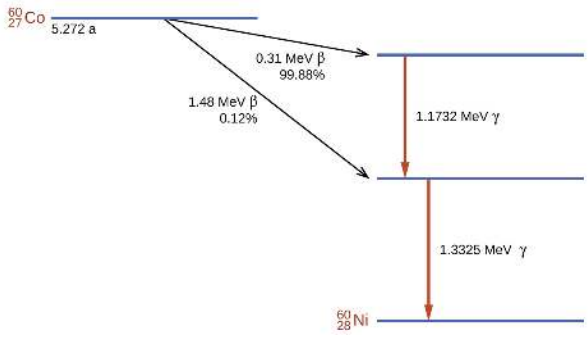

Figure 14.5.4: Co-60 undergoes a series of radioactive decays. The γ emissions are used for radiation therapy.

Radioisotopes are used in diverse ways to study the mechanisms of chemical reactions in plants and animals. These include labeling fertilizers in studies of nutrient uptake by plants and crop growth, investigations of digestive and milk-producing processes in cows, and studies on the growth and metabolism of animals and plants.

For example, the radioisotope C-14 was used to elucidate the details of how photosynthesis occurs. The overall reaction is:

$$6\,CO_2(g) + 6\,H_2O(l) \longrightarrow C_6H_{12}O_6(s) + 6\,O_2(g),$$

but the process is much more complex, proceeding through a series of steps in which various organic compounds are produced. In studies of the pathway of this reaction, plants were exposed to CO_2 containing a high concentration of $^{14}_{6}C$. At regular intervals, the plants were analyzed to determine which organic compounds contained carbon-14 and how much of each compound was present. From the time sequence in which the compounds appeared and the amount of each present at given time intervals, scientists learned more about the pathway of the reaction.

Commercial applications of radioactive materials are equally diverse (Figure 14.5.5). They include determining the thickness of films and thin metal sheets by exploiting the penetration power of various types of radiation. Flaws in metals used for structural purposes can be detected using high-energy gamma rays from cobalt-60 in a fashion similar to the way X-rays are used to examine the human body. In one form of pest control, flies are controlled by sterilizing male flies with γ radiation so that females breeding with them do not produce offspring. Many foods are preserved by radiation that kills microorganisms that cause the foods to spoil.



Figure 14.5.5: Common commercial uses of radiation include (a) X-ray examination of luggage at an airport and (b) preservation of food. (credit a: modification of work by the Department of the Navy; credit b: modification of work by the US Department of Agriculture)

A. A man is observing a monitor which shows the X-ray of luggages. B. Many apples on processing belts.

Americium-241, an α emitter with a half-life of 458 years, is used in tiny amounts in ionization-type smoke detectors (Figure 14.5.6). The α emissions from Am-241 ionize the air between two electrode plates in the ionizing chamber. A battery supplies a potential that causes movement of the ions, thus creating a small electric current. When smoke enters the chamber, the movement of the ions is impeded, reducing the conductivity of the air. This causes a marked drop in the current, triggering an alarm.

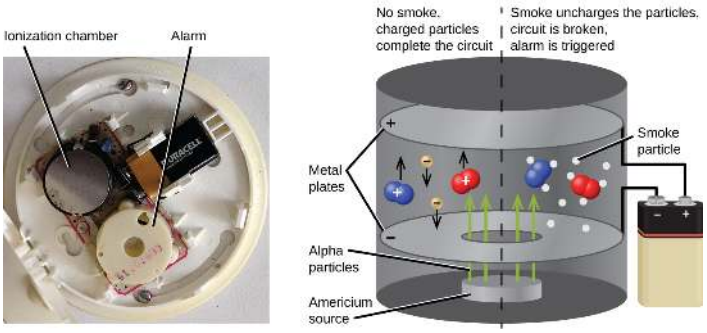

Figure 14.5.6: Inside a smoke detector, Am-241 emits α particles that ionize the air, creating a small electric current. During a fire, smoke particles impede the flow of ions, reducing the current and triggering an alarm. (credit a: modification of work by "Muffet"/Wikimedia Commons)

The inside of a smoke detector is shown with the alarm and ionization chamber labeled. In the picture beside it, a schematic shows the mechanisms of a smoke detector. The two oppositely charged metals plates in the detector are shown along with the Americium source on the bottom part emitting alpha particles. The schematic is divided into two parts, one to show the presence and the other for the absence of smoke.

Summary

Compounds known as radioactive tracers can be used to follow reactions, track the distribution of a substance, diagnose and treat medical conditions, and much more. Other radioactive substances are helpful for controlling pests, visualizing structures, providing fire warnings, and for many other applications. Hundreds of millions of nuclear medicine tests and procedures, using a wide variety of radioisotopes with relatively short half-lives, are performed every year in the US. Most of these radioisotopes have relatively short half-lives; some are short enough that the radioisotope must be made on-site at medical facilities. Radiation therapy uses high-energy radiation to kill cancer cells by damaging their DNA. The radiation used for this treatment may be delivered externally or internally.

Glossary

chemotherapy

similar to internal radiation therapy, but chemical rather than radioactive substances are introduced into the body to kill cancer cells

external beam radiation therapy

radiation delivered by a machine outside the body

internal radiation therapy

(also, brachytherapy) radiation from a radioactive substance introduced into the body to kill cancer cells

radiation therapy

use of high-energy radiation to damage the DNA of cancer cells, which kills them or keeps them from dividing

radioactive tracer

(also, radioactive label) radioisotope used to track or follow a substance by monitoring its radioactive emissions

This page titled 14.5: Uses of Radioisotopes is shared under a CC BY license and was authored, remixed, and/or curated by OpenStax.

- **21.5: Uses of Radioisotopes** by OpenStax is licensed CC BY 4.0. Original source: https://openstax.org/details/books/chemistry-2e.

14.6: Biological Effects of Radiation

Learning Objectives

- Describe the biological impact of ionizing radiation.
- Define units for measuring radiation exposure.
- Explain the operation of common tools for detecting radioactivity.
- List common sources of radiation exposure in the US.

The increased use of radioisotopes has led to increased concerns over the effects of these materials on biological systems (such as humans). All radioactive nuclides emit high-energy particles or electromagnetic waves. When this radiation encounters living cells, it can cause heating, break chemical bonds, or ionize molecules. The most serious biological damage results when these radioactive emissions fragment or ionize molecules. For example, alpha and beta particles emitted from nuclear decay reactions possess much higher energies than ordinary chemical bond energies. When these particles strike and penetrate matter, they produce ions and molecular fragments that are extremely reactive. The damage this does to biomolecules in living organisms can cause serious malfunctions in normal cell processes, taxing the organism's repair mechanisms and possibly causing illness or even death (Figure **14.6.1**).

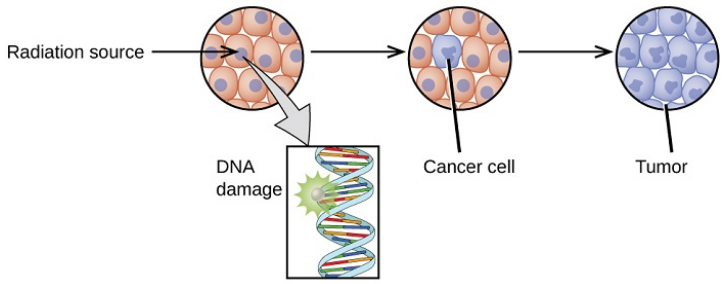

Figure **14.6.1**: Radiation can harm biological systems by damaging the DNA of cells. If this damage is not properly repaired, the cells may divide in an uncontrolled manner and cause cancer.

A diagram is shown which has a white sphere followed by a right-facing arrow and a large sphere composed of many smaller white and green spheres. The single sphere has impacted the larger sphere. A right-facing arrow leads from the larger sphere to a pair of smaller spheres which are collections of the same white and green spheres. A starburst pattern lies between these two spheres and has three right-facing arrows leading from it to two white spheres and a circle full of ten smaller, peach-colored circles with purple dots in their centers. An arrow leads downward from this circle to a box that contains a helical shape with a starburst near its top left side and is labeled "D N A damage." A right-facing arrow leads from this circle to a second circle, with nine smaller, peach-colored circles with purple dots in their centers and one fully purple small circle labeled "Cancer cell." A right-facing arrow leads to a final circle, this time full of the purple cells, that is labeled "Tumor."

Ionizing vs. Nonionizing Radiation

There is a large difference in the magnitude of the biological effects of nonionizing radiation (for example, light and microwaves) and ionizing radiation, emissions energetic enough to knock electrons out of molecules (for example, α and β particles, γ rays, X-rays, and high-energy ultraviolet radiation) (Figure **14.6.2**).

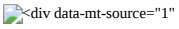

Figure **14.6.2**: Lower frequency, lower-energy electromagnetic radiation is nonionizing, and higher frequency, higher-energy electromagnetic radiation is ionizing.

Energy absorbed from nonionizing radiation speeds up the movement of atoms and molecules, which is equivalent to heating the sample. Although biological systems are sensitive to heat (as we might know from touching a hot stove or spending a day at the beach in the sun), a large amount of nonionizing radiation is necessary before dangerous levels are reached. Ionizing radiation, however, may cause much more severe damage by breaking bonds or removing electrons in biological molecules, disrupting their structure and function. The damage can also be done indirectly, by first ionizing H_2O (the most abundant molecule in living organisms), which forms a H_2O^+ ion that reacts with water, forming a hydronium ion and a hydroxyl radical:

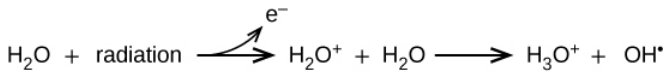

Figure **14.6.3**.

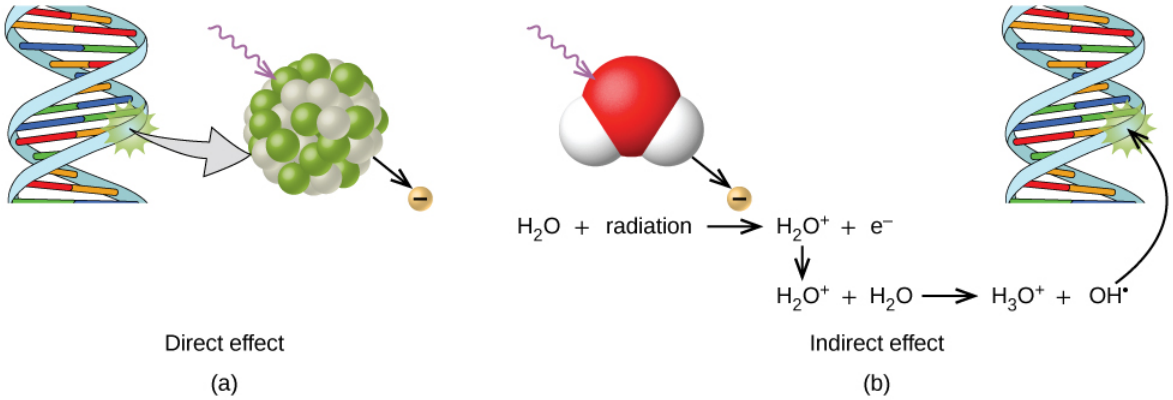

Figure **14.6.3**: Ionizing radiation can (a) directly damage a biomolecule by ionizing it or breaking its bonds, or (b) create an H_2O^+ ion, which reacts with H_2O to form a hydroxyl radical, which in turn reacts with the biomolecule, causing damage indirectly.

Biological Effects of Exposure to Radiation

Radiation can harm either the whole body (somatic damage) or eggs and sperm (genetic damage). Its effects are more pronounced in cells that reproduce rapidly, such as the stomach lining, hair follicles, bone marrow, and embryos. This is why patients undergoing radiation therapy often feel nauseous or sick to their stomach, lose hair, have bone aches, and so on, and why particular care must be taken when undergoing radiation therapy during pregnancy.

Different types of radiation have differing abilities to pass through material (Figure **14.6.4**). A very thin barrier, such as a sheet or two of paper, or the top layer of skin cells, usually stops alpha particles. Because of this, alpha particle sources are usually not dangerous if outside the body, but are quite hazardous if ingested or inhaled (see the Chemistry in Everyday Life feature on Radon Exposure). Beta particles will pass through a hand, or a thin layer of material like paper or wood, but are stopped by a thin layer of metal. Gamma radiation is very penetrating and can pass through a thick layer of most materials. Some high-energy gamma radiation is able to pass through a few feet of concrete. Certain dense, high atomic number elements (such as lead) can effectively attenuate gamma radiation with thinner material and are used for shielding. The ability of various kinds of emissions to cause ionization varies greatly, and some particles have almost no tendency to produce ionization. Alpha particles have about twice the ionizing power of fast-moving neutrons, about 10 times that of β particles, and about 20 times that of γ rays and X-rays.

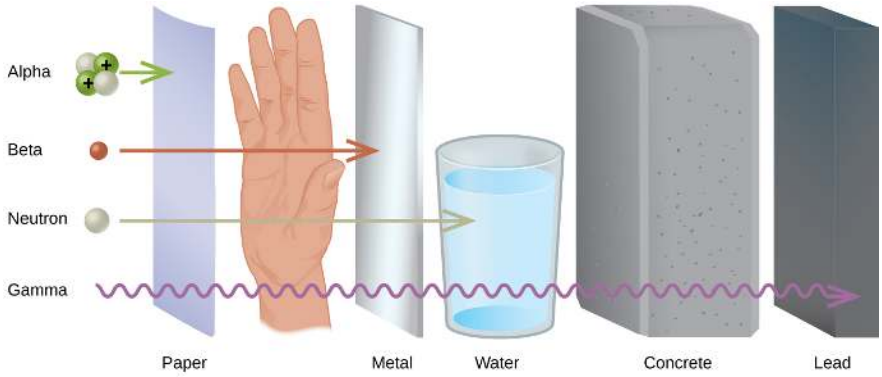

Figure **14.6.4**: The ability of different types of radiation to pass through material is shown. From least to most penetrating, they are alpha < beta < neutron < gamma.

A diagram shows four particles in a vertical column on the left, followed by an upright sheet of paper, a person's hand, an upright sheet of metal, a glass of water, a thick block of concrete and an upright, thick piece of lead. The top particle listed is made up of two white spheres and two green spheres that are labeled with positive signs and is labeled "Alpha." A right-facing arrow leads from this to the paper. The second particle is a red sphere labeled "Beta" and is followed by a right-facing arrow that passes through the paper and stops at the hand. The third particle is a white sphere labeled "Neutron" and is followed by a right-facing arrow that passes through the paper, hand and metal but is stopped at the glass of water. The fourth particle is shown by a squiggly arrow and it passes through all of the substances but stops at the lead. Terms at the bottom read, from left to right, "Paper," "Metal," "Water," "Concrete" and "Lead."

For many people, one of the largest sources of exposure to radiation is from radon gas (Rn-222). Radon-222 is an α emitter with a half–life of 3.82 days. It is one of the products of the radioactive decay series of U-238, which is found in trace amounts in soil and rocks. The radon gas that is produced slowly escapes from the ground and gradually seeps into homes and other structures above. Since it is about eight times more dense than air, radon gas accumulates in basements and lower floors, and slowly diffuses throughout buildings (Figure **14.6.5**).

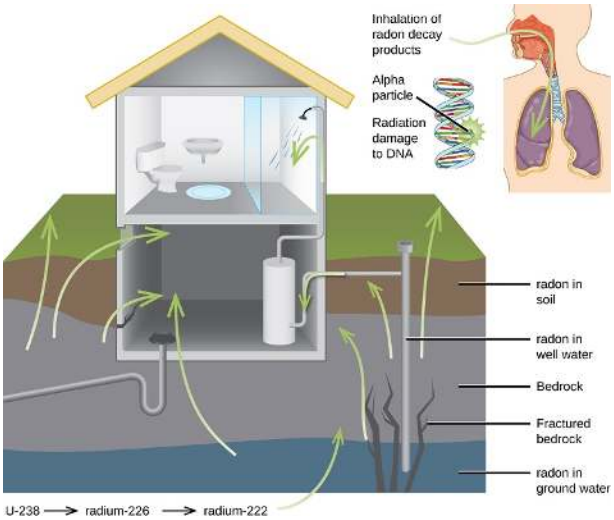

Figure **14.6.5**: Radon-222 seeps into houses and other buildings from rocks that contain uranium-238, a radon emitter. The radon enters through cracks in concrete foundations and basement floors, stone or porous cinderblock foundations, and openings for water and gas pipes.

A cut-away image of the side of a house and four layers of the ground it rests on is shown, as well as a second cut-away image of a person's head and chest cavity. The house is shown with a restroom on the second floor and a basement with a water heater as the first floor. Green arrows lead from the lowest ground layer, labeled "radon in ground water," from the third ground layer, labeled "Bedrock" and "Fractured bedrock," from the second layer, labeled "radon in well water," and from the top layer, labeled "radon in soil to the inside of the basement area. In the smaller image of the torso, a green arrow is shown to enter the person's nasal passage and travel to the lungs. This is labeled "Inhalation of radon decay products." A small coiled, helical structure next to the torso is labeled "alpha particle" on one section where it has a starburst pattern and "Radiation damage to D N A" on another segment.

Radon is found in buildings across the country, with amounts dependent on location. The average concentration of radon inside houses in the US (1.25 pCi/L) is about three times the level found in outside air, and about one in six houses have radon levels high enough that remediation efforts to reduce the radon concentration are recommended. Exposure to radon increases one's risk of

getting cancer (especially lung cancer), and high radon levels can be as bad for health as smoking a carton of cigarettes a day. Radon is the number one cause of lung cancer in nonsmokers and the second leading cause of lung cancer overall. Radon exposure is believed to cause over 20,000 deaths in the US per year.

Measuring Radiation Exposure

Several different devices are used to detect and measure radiation, including Geiger counters, scintillation counters (scintillators), and radiation dosimeters (Figure **14.6.6**). Probably the best-known radiation instrument, the Geiger counter (also called the Geiger-Müller counter) detects and measures radiation. Radiation causes the ionization of the gas in a Geiger-Müller tube. The rate of ionization is proportional to the amount of radiation. A scintillation counter contains a scintillator—a material that emits light (luminesces) when excited by ionizing radiation—and a sensor that converts the light into an electric signal. Radiation dosimeters also measure ionizing radiation and are often used to determine personal radiation exposure. Commonly used types are electronic, film badge, thermoluminescent, and quartz fiber dosimeters.

Figure **14.6.6**: Devices such as (a) Geiger counters, (b) scintillators, and (c) dosimeters can be used to measure radiation. (Credit c: modification of work by "osaMu"/Wikimedia commons.)

Three photographs are shown and labeled "a," "b" and "c." Photo a shows a Geiger counter sitting on a table. It is made up of a metal box with a read-out screen and a wire leading away from the box connected to a sensor wand. Photograph b shows a collection of tall and short vertical tubes arranged in a grouping while photograph c shows a person's hand holding a small machine with a digital readout while standing on the edge of a roadway.

A variety of units are used to measure various aspects of radiation (Table **14.6.1**). The SI unit for rate of radioactive decay is the becquerel (Bq), with 1 Bq = 1 disintegration per second. The curie (Ci) and millicurie (mCi) are much larger units and are frequently used in medicine (1 curie = 1 Ci = $\mathbf{3.7 \times 10^{10}}$ disintegrations per second). The SI unit for measuring radiation dose is the gray (Gy), with 1 Gy = 1 J of energy absorbed per kilogram of tissue. In medical applications, the radiation absorbed dose (rad) is more often used (1 rad = 0.01 Gy; 1 rad results in the absorption of 0.01 J/kg of tissue). The SI unit measuring tissue damage caused by radiation is the sievert (Sv). This takes into account both the energy and the biological effects of the type of radiation involved in the radiation dose.

Table **14.6.1**: Units Used for Measuring Radiation

Measurement Purpose	Unit	Quantity Measured	Description
activity of source	becquerel (Bq)	radioactive decays or emissions	amount of sample that undergoes 1 decay/second
	curie (Ci)		amount of sample that undergoes $\mathbf{3.7 \times 10^{10}}$ **decays/second**
absorbed dose	gray (Gy)	energy absorbed per kg of tissue	1 Gy = 1 J/kg tissue
	radiation absorbed dose (rad)		1 rad = 0.01 J/kg tissue
biologically effective dose	sievert (Sv)	tissue damage	Sv = RBE × Gy
	roentgen equivalent for man (rem)		Rem = RBE × rad

The roentgen equivalent for man (rem) is the unit for radiation damage that is used most frequently in medicine (1 rem = 1 Sv). Note that the tissue damage units (rem or Sv) includes the energy of the radiation dose (rad or Gy), along with a biological factor

referred to as the RBE (for relative biological effectiveness), that is an approximate measure of the relative damage done by the radiation. These are related by:

$$\text{number of rems} = \text{RBE} \times \text{number of rads} \tag{14.6.1}$$

with RBE approximately 10 for α radiation, 2(+) for protons and neutrons, and 1 for β and γ radiation.

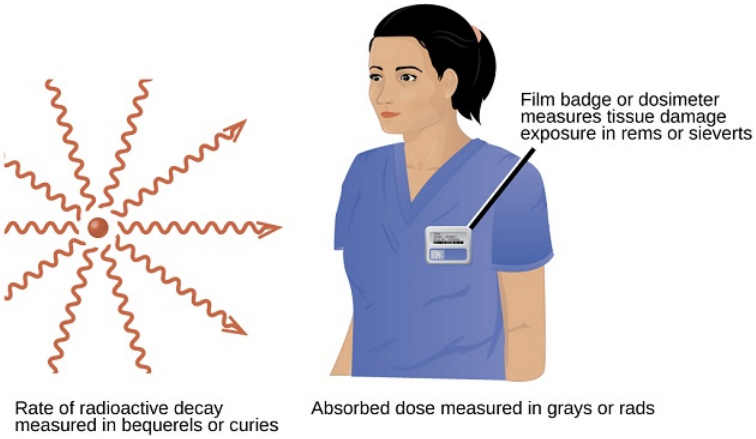

Figure **14.6.7**: Different units are used to measure the rate of emission from a radioactive source, the energy that is absorbed from the source, and the amount of damage the absorbed radiation does. (CC by 4.0; OpenStax)

Two images are shown. The first, labeled “Rate of radioactive decay measured in becquerels or curies,” shows a red sphere with ten red squiggly arrows facing away from it in a 360 degree circle. The second image shows the head and torso of a woman wearing medical scrubs with a badge on her chest. The caption to the badge reads “Film badge or dosimeter measures tissue damage exposure in rems or sieverts” while a phrase under this image states “Absorbed dose measured in grays or rads.”

Example 14.6.1: Amount of Radiation

Cobalt-60 ($t_{1/2}$ = 5.26 y) is used in cancer therapy since the γ rays it emits can be focused in small areas where the cancer is located. A 5.00-g sample of Co-60 is available for cancer treatment.

a. What is its activity in Bq?
b. What is its activity in Ci?

Solution

The activity is given by:

$$\text{Activity} = \lambda N = \left(\frac{\ln 2}{t_{1/2}}\right) N = \left(\frac{\ln 2}{5.26\ \text{y}}\right) \times 5.00\ \text{g} = 0.659\ \frac{\text{g}}{\text{y}}\ \text{of}\ {}^{60}\text{Co that decay}$$

And to convert this to decays per second:

$$0.659\ \frac{\text{g}}{\text{y}} \times \frac{\text{y}}{365\ \text{day}} \times \frac{1\ \text{day}}{24\ \text{hours}} \times \frac{1\ \text{h}}{3,600\ \text{s}} \times \frac{1\ \text{mol}}{59.9\ \text{g}} \times \frac{6.02 \times 10^{23}\ \text{atoms}}{1\ \text{mol}} \times \frac{1\ \text{decay}}{1\ \text{atom}}$$

$$= 2.10 \times 10^{14}\ \frac{\text{decay}}{\text{s}}$$

(a) Since $1\ \text{Bq} = 1\ \frac{\text{decay}}{\text{s}}$, the activity in Becquerel (Bq) is:

$$2.10 \times 10^{14} \frac{\text{decay}}{\text{s}} \times \left(\frac{1\ \text{Bq}}{1\ \frac{\text{decay}}{\text{s}}}\right) = 2.10 \times 10^{14}\ \text{Bq}$$

(b) Since $1\ \text{Ci} = 3.7 \times 10^{11}\ \frac{\text{decay}}{\text{s}}$, the activity in curie (Ci) is:

$$2.10 \times 10^{14} \frac{\text{decay}}{\text{s}} \times \left(\frac{1\ \text{Ci}}{3.7 \times 10^{11}\ \frac{\text{decay}}{\text{s}}}\right) = 5.7 \times 10^{2}\ \text{Ci}$$

? Exercise 14.6.1

Tritium is a radioactive isotope of hydrogen ($t_{1/2} = 12.32$ years) that has several uses, including self-powered lighting, in which electrons emitted in tritium radioactive decay cause phosphorus to glow. Its nucleus contains one proton and two neutrons, and the atomic mass of tritium is 3.016 amu. What is the activity of a sample containing 1.00mg of tritium (a) in Bq and (b) in Ci?

Answer a

3.56×10^{11} Bq

Answer b

0.962 Ci

Effects of Long-term Radiation Exposure on the Human Body

The effects of radiation depend on the type, energy, and location of the radiation source, and the length of exposure. As shown in Figure 14.6.8, the average person is exposed to background radiation, including cosmic rays from the sun and radon from uranium in the ground (see the Chemistry in Everyday Life feature on Radon Exposure); radiation from medical exposure, including CAT scans, radioisotope tests, X-rays, and so on; and small amounts of radiation from other human activities, such as airplane flights (which are bombarded by increased numbers of cosmic rays in the upper atmosphere), radioactivity from consumer products, and a variety of radionuclides that enter our bodies when we breathe (for example, carbon-14) or through the food chain (for example, potassium-40, strontium-90, and iodine-131).

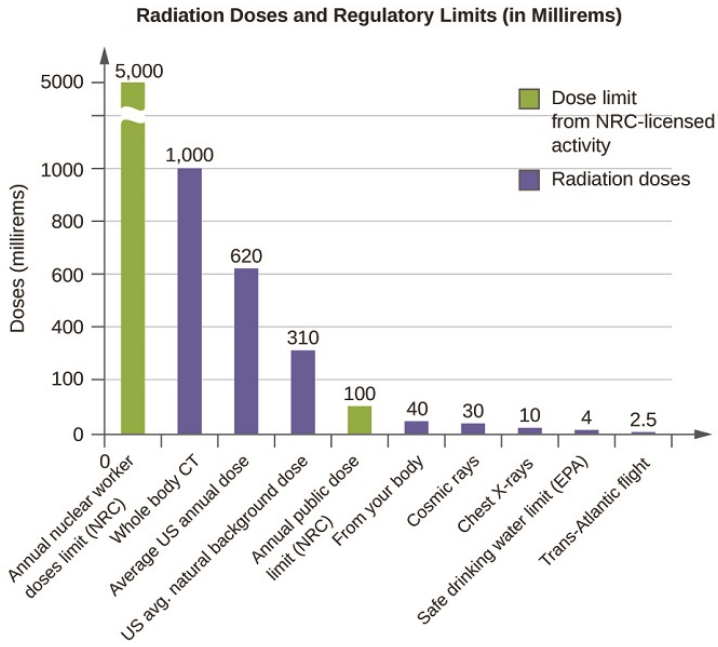

Figure 14.6.8: The total annual radiation exposure for a person in the US is about 620 mrem. The various sources and their relative amounts are shown in this bar graph. (source: U.S. Nuclear Regulatory Commission).

A bar graph titled “Radiation Doses and Regulatory Limits, open parenthesis, in Millirems, close parenthesis” is shown. The y-axis is labeled “Doses in Millirems” and has values from 0 to 5000 with a break between 1000 and 5000 to indicate a different scale to the top of the graph. The y-axis is labeled corresponding to each bar. The first bar, measured to 5000 on the y-axis, is drawn in red and is labeled “Annual Nuclear Worker Doses Limit, open parenthesis, N R C, close parenthesis.” The second bar, measured to 1000 on the y-axis, is drawn in blue and is labeled “Whole Body C T” while the third bar, measured to 620 on the y-axis, is drawn in blue and is labeled “Average U period S period Annual Dose.” The fourth bar, measured to 310 on the y-axis, is drawn in blue and is labeled “U period S period Natural Background Dose” while the fifth bar, measured to 100 on the y-axis and drawn in red reads “Annual Public Dose Limit, open parenthesis, N R C, close parenthesis.” The sixth bar, measured to 40 on the y-axis, is drawn in blue and is labeled “From Your Body” while the seventh bar, measured to 30 on the y-axis and drawn in blue reads “Cosmic rays.” The eighth bar, measured to 4 on the y-axis, is drawn in blue and is labeled “Safe Drinking Water Limit, open parenthesis, E P A, close parenthesis” while the ninth bar, measured to 2.5 on the y-axis and drawn in red reads “Trans Atlantic Flight.” A legend on the graph shows that red means “Dose Limit From N R C dash licensed activity” while blue means “Radiation Doses.”

A short-term, sudden dose of a large amount of radiation can cause a wide range of health effects, from changes in blood chemistry to death. Short-term exposure to tens of rems of radiation will likely cause very noticeable symptoms or illness; a dose of about 500 rems is estimated to have a 50% probability of causing the death of the victim within 30 days of exposure. Exposure to radioactive emissions has a cumulative effect on the body during a person's lifetime, which is another reason why it is important to avoid any unnecessary exposure to radiation. Health effects of short-term exposure to radiation are shown in Table **14.6.2**.

Table **14.6.2**: Health Effects of Radiation

Exposure (rem)	Health Effect	Time to Onset (Without Treatment)
5–10	changes in blood chemistry	—
50	nausea	hours
55	fatigue	—
70	vomiting	—
75	hair loss	2–3 weeks
90	diarrhea	—
100	hemorrhage	—
400	possible death	within 2 months
1000	destruction of intestinal lining	—
	internal bleeding	—
	death	1–2 weeks
2000	damage to central nervous system	—
	loss of consciousness	minutes
	death	hours to days

It is impossible to avoid some exposure to ionizing radiation. We are constantly exposed to background radiation from a variety of natural sources, including cosmic radiation, rocks, medical procedures, consumer products, and even our own atoms. We can minimize our exposure by blocking or shielding the radiation, moving farther from the source, and limiting the time of exposure.

Summary

We are constantly exposed to radiation from a variety of naturally occurring and human-produced sources. This radiation can affect living organisms. Ionizing radiation is the most harmful because it can ionize molecules or break chemical bonds, which damages the molecule and causes malfunctions in cell processes. It can also create reactive hydroxyl radicals that damage biological molecules and disrupt physiological processes. Radiation can cause somatic or genetic damage, and is most harmful to rapidly reproducing cells. Types of radiation differ in their ability to penetrate material and damage tissue, with alpha particles the least penetrating, but potentially most damaging, and gamma rays the most penetrating.

Various devices, including Geiger counters, scintillators, and dosimeters, are used to detect and measure radiation, and monitor radiation exposure. We use several units to measure radiation: becquerels or curies for rates of radioactive decay; gray or rads for energy absorbed; and rems or sieverts for biological effects of radiation. Exposure to radiation can cause a wide range of health effects, from minor to severe, including death. We can minimize the effects of radiation by shielding with dense materials such as lead, moving away from the source of radiation, and limiting time of exposure.

Footnotes

1. 1 Source: US Environmental Protection Agency

Glossary

becquerel (Bq)
SI unit for rate of radioactive decay; 1 Bq = 1 disintegration/s.

curie (Ci)
Larger unit for rate of radioactive decay frequently used in medicine; 1 Ci = 3.7×10^{10} disintegrations/s.

Geiger counter
Instrument that detects and measures radiation via the ionization produced in a Geiger-Müller tube.

gray (Gy)
SI unit for measuring radiation dose; 1 Gy = 1 J absorbed/kg tissue.

ionizing radiation
Radiation that can cause a molecule to lose an electron and form an ion.

millicurie (mCi)
Larger unit for rate of radioactive decay frequently used in medicine; 1 Ci = 3.7×10^{10} disintegrations/s.

nonionizing radiation
Radiation that speeds up the movement of atoms and molecules; it is equivalent to heating a sample, but is not energetic enough to cause the ionization of molecules.

radiation absorbed dose (rad)
SI unit for measuring radiation dose, frequently used in medical applications; 1 rad = 0.01 Gy.

radiation dosimeter
Device that measures ionizing radiation and is used to determine personal radiation exposure.

relative biological effectiveness (RBE)
Measure of the relative damage done by radiation.

roentgen equivalent man (rem)
Unit for radiation damage, frequently used in medicine; 1 rem = 1 Sv.

scintillation counter
Instrument that uses a scintillator—a material that emits light when excited by ionizing radiation—to detect and measure radiation.

sievert (Sv)
SI unit measuring tissue damage caused by radiation; takes energy and biological effects of radiation into account.

This page titled 14.6: Biological Effects of Radiation is shared under a CC BY license and was authored, remixed, and/or curated by OpenStax.

- **21.6: Biological Effects of Radiation** by OpenStax is licensed CC BY 4.0. Original source: https://openstax.org/details/books/chemistry-2e.

14.7: Nuclear Chemistry (Exercises)

21.2: Nuclear Structure and Stability

Q21.2.1

Write the following isotopes in hyphenated form (e.g., “carbon-14”)

a. $^{24}_{11}\mathrm{Na}$
b. $^{29}_{13}\mathrm{Al}$
c. $^{73}_{36}\mathrm{Kr}$
d. $^{194}_{77}\mathrm{Ir}$

Q21.2.2

Write the following isotopes in nuclide notation (e.g., " $^{14}_{6}\mathrm{C}$ ")

a. oxygen-14
b. copper-70
c. tantalum-175
d. francium-217

Q21.2.3

For the following isotopes that have missing information, fill in the missing information to complete the notation

a. $^{34}_{14}\mathrm{X}$
b. $_{\mathrm{P}}{}^{36}$
c. $^{57}_{\mathrm{X}}\mathrm{Mn}$
d. $^{121}_{56}\mathrm{X}$

Q21.2.4

For each of the isotopes in Question 21.2.3, determine the numbers of protons, neutrons, and electrons in a neutral atom of the isotope.

Q21.2.5

Write the nuclide notation, including charge if applicable, for atoms with the following characteristics:

a. 25 protons, 20 neutrons, 24 electrons
b. 45 protons, 24 neutrons, 43 electrons
c. 53 protons, 89 neutrons, 54 electrons
d. 97 protons, 146 neutrons, 97 electrons

Q21.2.6

Calculate the density of the $^{24}_{12}\mathrm{Mg}$ nucleus in g/mL, assuming that it has the typical nuclear diameter of 1×10^{-13} cm and is spherical in shape.

Q21.2.7

What are the two principal differences between nuclear reactions and ordinary chemical changes?

Q21.2.8

The mass of the atom $^{23}_{11}\mathrm{Na}$ is 22.9898 amu.

a. Calculate its binding energy per atom in millions of electron volts.
b. Calculate its binding energy per nucleon.

Q21.2.9

Which of the following nuclei lie within the band of stability?

a. chlorine-37
b. calcium-40
c. ^{204}Bi
d. ^{56}Fe
e. ^{206}Pb
f. ^{211}Pb
g. ^{222}Rn
h. carbon-14

Q21.2.10

Which of the following nuclei lie within the band of stability?

a. argon-40
b. oxygen-16
c. ^{122}Ba
d. ^{58}Ni
e. ^{205}Tl
f. ^{210}Tl
g. ^{226}Ra
h. magnesium-24

21.3: Nuclear Equations

Q21.3.1

Write a brief description or definition of each of the following:

a. nucleon
b. α particle
c. β particle
d. positron
e. γ ray
f. nuclide
g. mass number
h. atomic number

Q21.3.2

Which of the various particles (α particles, β particles, and so on) that may be produced in a nuclear reaction are actually nuclei?

Q21.3.3

Complete each of the following equations by adding the missing species:

a. $^{27}_{13}\mathrm{Al} + {}^{4}_{2}\mathrm{He} \longrightarrow \ ? + {}^{1}_{0}\mathrm{n}$
b. $^{239}_{94}\mathrm{Pu} + \ ? \longrightarrow {}^{242}_{96}\mathrm{Cm} + {}^{1}_{0}\mathrm{n}$
c. $^{14}_{7}\mathrm{N} + {}^{4}_{2}\mathrm{He} \longrightarrow \ ? + {}^{1}_{1}\mathrm{H}$
d. $^{235}_{92}\mathrm{U} \longrightarrow \ ? + {}^{135}_{55}\mathrm{Cs} + 4{}^{1}_{0}\mathrm{n}$

Q21.3.4

Complete each of the following equations:

a. $^{7}_{3}\mathrm{Li} + \ ? \longrightarrow 2{}^{4}_{2}\mathrm{He}$
b. $^{14}_{6}\mathrm{C} \longrightarrow {}^{14}_{7}\mathrm{N} + \ ?$

c. $^{27}_{13}\mathrm{Al} + {}^{4}_{2}\mathrm{He} \longrightarrow \; ? + {}^{1}_{0}\mathrm{n}$
d. $^{250}_{96}\mathrm{Cm} \longrightarrow \; ? + {}^{98}_{38}\mathrm{Sr} + 4{}^{1}_{0}\mathrm{n}$

Q21.3.5

Write a balanced equation for each of the following nuclear reactions:

a. the production of ^{17}O from ^{14}N by α particle bombardment
b. the production of ^{14}C from ^{14}N by neutron bombardment
c. the production of ^{233}Th from ^{232}Th by neutron bombardment
d. the production of ^{239}U from ^{238}U by $^{2}_{1}\mathrm{H}$ bombardment

Q21.3.6

Technetium-99 is prepared from ^{98}Mo. Molybdenum-98 combines with a neutron to give molybdenum-99, an unstable isotope that emits a β particle to yield an excited form of technetium-99, represented as ^{99}Tc*. This excited nucleus relaxes to the ground state, represented as ^{99}Tc, by emitting a γ ray. The ground state of ^{99}Tc then emits a β particle. Write the equations for each of these nuclear reactions.

Q21.3.7

The mass of the atom $^{19}_{9}\mathrm{F}$ is 18.99840 amu.

a. Calculate its binding energy per atom in millions of electron volts.
b. Calculate its binding energy per nucleon.

Q21.3.8

For the reaction $^{14}_{6}\mathrm{C} \longrightarrow {}^{14}_{7}\mathrm{N} + \; ?$, if 100.0 g of carbon reacts, what volume of nitrogen gas (N_2) is produced at 273 K and 1 atm?

21.4: Radioactive Decay

Q21.4.1

What are the types of radiation emitted by the nuclei of radioactive elements?

Q21.4.2

What changes occur to the atomic number and mass of a nucleus during each of the following decay scenarios?

a. an α particle is emitted
b. a β particle is emitted
c. γ radiation is emitted
d. a positron is emitted
e. an electron is captured

Q21.4.3

What is the change in the nucleus that results from the following decay scenarios?

a. emission of a β particle
b. emission of a β^{+} particle
c. capture of an electron

Q21.4.4

Many nuclides with atomic numbers greater than 83 decay by processes such as electron emission. Explain the observation that the emissions from these unstable nuclides also normally include α particles.

Q21.4.5

Why is electron capture accompanied by the emission of an X-ray?

Q21.4.6

Explain how unstable heavy nuclides (atomic number > 83) may decompose to form nuclides of greater stability (a) if they are below the band of stability and (b) if they are above the band of stability.

Q21.4.7

Which of the following nuclei is most likely to decay by positron emission? Explain your choice.

a. chromium-53
b. manganese-51
c. iron-59

Q21.4.8

The following nuclei do not lie in the band of stability. How would they be expected to decay? Explain your answer.

a. $^{34}_{15}\mathrm{P}$
b. $^{239}_{92}\mathrm{U}$
c. $^{38}_{20}\mathrm{Ca}$
d. $^{3}_{1}\mathrm{H}$
e. $^{245}_{94}\mathrm{Pu}$

Q21.4.9

The following nuclei do not lie in the band of stability. How would they be expected to decay?

a. $^{28}_{15}\mathrm{P}$
b. $^{235}_{92}\mathrm{U}$
c. $^{37}20\mathrm{Ca}$
d. $^{9}_{3}\mathrm{Li}$
e. $^{245}_{96}\mathrm{Cm}$

Q21.4.10

Predict by what mode(s) of spontaneous radioactive decay each of the following unstable isotopes might proceed:

a. $^{6}_{2}\mathrm{He}$
b. $^{60}_{30}\mathrm{Zn}$
c. $^{235}_{91}\mathrm{Pa}$
d. $^{241}_{94}\mathrm{Np}$
e. $^{18}\mathrm{F}$
f. $^{129}\mathrm{Ba}$
g. $^{237}\mathrm{Pu}$

Q21.4.11

Write a nuclear reaction for each step in the formation of $^{218}_{84}\mathrm{Po}$ from $^{238}_{92}\mathrm{U}$, which proceeds by a series of decay reactions involving the step-wise emission of α, β, β, α, α, α, α particles, in that order.

Q21.4.12

Write a nuclear reaction for each step in the formation of $^{208}_{82}\mathrm{Pb}$ from $^{228}_{90}\mathrm{Th}$, which proceeds by a series of decay reactions involving the step-wise emission of α, α, α, α, β, β, α particles, in that order.

Q21.4.13

Define the term half-life and illustrate it with an example.

Q21.4.14

A 1.00×10^{-6}-g sample of nobelium, $^{254}_{102}\mathrm{No}$, has a half-life of 55 seconds after it is formed. What is the percentage of $^{254}_{102}\mathrm{No}$ remaining at the following times?

a. 5.0 min after it forms
b. 1.0 h after it forms

Q21.4.15

^{239}Pu is a nuclear waste byproduct with a half-life of 24,000 y. What fraction of the ^{239}Pu present today will be present in 1000 y?

Q21.4.16

The isotope ^{208}Tl undergoes β decay with a half-life of 3.1 min.

a. What isotope is produced by the decay?
b. How long will it take for 99.0% of a sample of pure ^{208}Tl to decay?
c. What percentage of a sample of pure ^{208}Tl remains un-decayed after 1.0 h?

Q21.4.17

If 1.000 g of $^{226}_{88}\mathrm{Ra}$ produces 0.0001 mL of the gas $^{222}_{86}\mathrm{Rn}$ at STP (standard temperature and pressure) in 24 h, what is the half-life of ^{226}Ra in years?

Q21.4.18

The isotope $^{90}_{38}\mathrm{Sr}$ is one of the extremely hazardous species in the residues from nuclear power generation. The strontium in a 0.500-g sample diminishes to 0.393 g in 10.0 y. Calculate the half-life.

Q21.4.19

Technetium-99 is often used for assessing heart, liver, and lung damage because certain technetium compounds are absorbed by damaged tissues. It has a half-life of 6.0 h. Calculate the rate constant for the decay of $^{99}_{43}\mathrm{Tc}$.

Q21.4.20

What is the age of mummified primate skin that contains 8.25% of the original quantity of ^{14}C?

Q21.4.21

A sample of rock was found to contain 8.23 mg of rubidium-87 and 0.47 mg of strontium-87.

a. Calculate the age of the rock if the half-life of the decay of rubidium by β emission is 4.7×10^{10} y.
b. If some $^{87}_{38}\mathrm{Sr}$ was initially present in the rock, would the rock be younger, older, or the same age as the age calculated in (a)? Explain your answer.

Q21.4.22

A laboratory investigation shows that a sample of uranium ore contains 5.37 mg of $^{238}_{92}\mathrm{U}$ and 2.52 mg of $^{206}_{82}\mathrm{Pb}$. Calculate the age of the ore. The half-life of $^{238}_{92}\mathrm{U}$ is 4.5×10^9 yr.

Q21.4.23

Plutonium was detected in trace amounts in natural uranium deposits by Glenn Seaborg and his associates in 1941. They proposed that the source of this ^{239}Pu was the capture of neutrons by ^{238}U nuclei. Why is this plutonium not likely to have been trapped at the time the solar system formed 4.7×10^9 years ago?

Q21.4.24

A $^{7}_{4}\mathrm{Be}$ atom (mass = 7.0169 amu) decays into a $^{7}_{3}\mathrm{Li}$ atom (mass = 7.0160 amu) by electron capture. How much energy (in millions of electron volts, MeV) is produced by this reaction?

Q21.4.25

A $^{8}_{5}\mathrm{B}$ atom (mass = 8.0246 amu) decays into a $^{8}_{4}\mathrm{Be}$ atom (mass = 8.0053 amu) by loss of a β^+ particle (mass = 0.00055 amu) or by electron capture. How much energy (in millions of electron volts) is produced by this reaction?

Q21.4.26

Isotopes such as ^{26}Al (half-life: 7.2×10^5 years) are believed to have been present in our solar system as it formed, but have since decayed and are now called extinct nuclides.

a. ^{26}Al decays by β^+ emission or electron capture. Write the equations for these two nuclear transformations.
b. The earth was formed about 4.7×10^9 (4.7 billion) years ago. How old was the earth when 99.999999% of the ^{26}Al originally present had decayed?

Q21.4.27

Write a balanced equation for each of the following nuclear reactions:

a. bismuth-212 decays into polonium-212
b. beryllium-8 and a positron are produced by the decay of an unstable nucleus
c. neptunium-239 forms from the reaction of uranium-238 with a neutron and then spontaneously converts into plutonium-239
d. strontium-90 decays into yttrium-90

Q21.4.28

Write a balanced equation for each of the following nuclear reactions:

a. mercury-180 decays into platinum-176
b. zirconium-90 and an electron are produced by the decay of an unstable nucleus
c. thorium-232 decays and produces an alpha particle and a radium-228 nucleus, which decays into actinium-228 by beta decay
d. neon-19 decays into fluorine-19

21.5: Transmutation and Nuclear Energy

Q21.5.1

Write the balanced nuclear equation for the production of the following transuranium elements:

a. berkelium-244, made by the reaction of Am-241 and He-4
b. fermium-254, made by the reaction of Pu-239 with a large number of neutrons
c. lawrencium-257, made by the reaction of Cf-250 and B-11
d. dubnium-260, made by the reaction of Cf-249 and N-15

Q21.5.2

How does nuclear fission differ from nuclear fusion? Why are both of these processes exothermic?

Q21.5.3

Both fusion and fission are nuclear reactions. Why is a very high temperature required for fusion, but not for fission?

Q21.5.4

Cite the conditions necessary for a nuclear chain reaction to take place. Explain how it can be controlled to produce energy, but not produce an explosion.

Q21.5.5

Describe the components of a nuclear reactor.

Q21.5.6

In usual practice, both a moderator and control rods are necessary to operate a nuclear chain reaction safely for the purpose of energy production. Cite the function of each and explain why both are necessary.

Q21.5.7

Describe how the potential energy of uranium is converted into electrical energy in a nuclear power plant.

Q21.5.8

The mass of a hydrogen atom (^1_1H) is 1.007825 amu; that of a tritium atom (^3_1H) is 3.01605 amu; and that of an α particle is 4.00150 amu. How much energy in kilojoules per mole of ^4_2He produced is released by the following fusion reaction: $^1_1\text{H} + {}^3_1\text{H} \longrightarrow {}^4_2\text{He}$.

21.6: Uses of Radioisotopes

Q21.6.1

How can a radioactive nuclide be used to show that the equilibrium:

$$\text{AgCl}(s) \rightleftharpoons \text{Ag}^+(aq) + \text{Cl}^-(aq) \tag{14.7.1}$$

is a dynamic equilibrium?

Q21.6.2

Technetium-99m has a half-life of 6.01 hours. If a patient injected with technetium-99m is safe to leave the hospital once 75% of the dose has decayed, when is the patient allowed to leave?

Q21.6.3

Iodine that enters the body is stored in the thyroid gland from which it is released to control growth and metabolism. The thyroid can be imaged if iodine-131 is injected into the body. In larger doses, I-131 is also used as a means of treating cancer of the thyroid. I-131 has a half-life of 8.70 days and decays by β^- emission.

a. Write a nuclear equation for the decay.
b. How long will it take for 95.0% of a dose of I-131 to decay?

21.7: Biological Effects of Radiation

Q21.7.1

If a hospital were storing radioisotopes, what is the minimum containment needed to protect against:

a. cobalt-60 (a strong γ emitter used for irradiation)
b. molybdenum-99 (a beta emitter used to produce technetium-99 for imaging)

Q21.7.2

Based on what is known about Radon-222's primary decay method, why is inhalation so dangerous?

Q21.7.3

Given specimens uranium-232 ($t_{1/2} = 68.9\ \text{y}$) and uranium-233 ($t_{1/2} = 159,200\ \text{y}$) of equal mass, which one would have greater activity and why?

Q21.7.4

A scientist is studying a 2.234 g sample of thorium-229 ($t_{1/2}$ = 7340 y) in a laboratory.

a. What is its activity in Bq?
b. What is its activity in Ci?

Q21.7.5

Given specimens neon-24 ($t_{1/2} = 3.38\ \text{min}$) and bismuth-211 ($t_{1/2} = 2.14\ \text{min}$) of equal mass, which one would have greater activity and why?

This page titled 14.7: Nuclear Chemistry (Exercises) is shared under a CC BY license and was authored, remixed, and/or curated by OpenStax.

15: Appendices

This page is a placeholder created because the page was deleted, but has sub-pages.

This page titled 15: Appendices is shared under a CC BY license and was authored, remixed, and/or curated by OpenStax.

15.1: Composition of Commercial Acids and Bases

Composition of Commercial Acids and Bases			
Acid or Base[1]	Density (g/mL)[2]	Percentage by Mass	Molarity
acetic acid, glacial	1.05	99.5%	17.4
aqueous ammonia[3]	0.90	28%	14.8
hydrochloric acid	1.18	36%	11.6
nitric acid	1.42	71%	16.0
perchloric acid	1.67	70%	11.65
phosphoric acid	1.70	85%	14.7
sodium hydroxide	1.53	50%	19.1
sulfuric acid	1.84	96%	18.0

Footnotes

1. 1 Acids and bases are commercially available as aqueous solutions. This table lists properties (densities and concentrations) of common acid and base solutions. Nominal values are provided in cases where the manufacturer cites a range of concentrations and densities.
2. 2 This column contains specific gravity data. In the case of this table, specific gravity is the ratio of density of a substance to the density of pure water at the same conditions. Specific gravity is often cited on commercial labels.
3. 3 This solution is sometimes called “ammonium hydroxide,” although this term is not chemically accurate.

This page titled 15.1: Composition of Commercial Acids and Bases is shared under a CC BY license and was authored, remixed, and/or curated by OpenStax.

15.2: Fundamental Physical Constants

Fundamental Physical Constants	
Name and Symbol	Value
atomic mass unit (amu)	$1.6605402 \times 10^{-27}$ kg
Avogadro's number	6.0221367×10^{23} mol^{-1}
Boltzmann's constant (k)	1.380658×10^{-23} J K^{-1}
charge-to-mass ratio for electron (e/m_e)	$1.75881962 \times 10^{11}$ C kg^{-1}
electron charge (e)	$1.60217733 \times 10^{-19}$ C
electron rest mass (m_e)	$9.1093897 \times 10^{-31}$ kg
Faraday's constant (F)	9.6485309×10^{4} C mol^{-1}
gas constant (R)	8.205784×10^{-2} L atm mol^{-1} K^{-1} = 8.314510 J mol^{-1} K^{-1}
molar volume of an ideal gas, 1 atm, 0 °C	22.41409 L mol^{-1}
molar volume of an ideal gas, 1 bar, 0 °C	22.71108 L mol^{-1}
neutron rest mass (m_n)	$1.6749274 \times 10^{-27}$ kg
Planck's constant (h)	$6.6260755 \times 10^{-34}$ J s
proton rest mass (m_p)	$1.6726231 \times 10^{-27}$ kg
Rydberg constant (R)	$1.0973731534 \times 10^{7}$ m^{-1} = $2.1798736 \times 10^{-18}$ J
speed of light (in vacuum) (c)	2.99792458×10^{8} m s^{-1}

This page titled 15.2: Fundamental Physical Constants is shared under a CC BY license and was authored, remixed, and/or curated by OpenStax.

15.3: The Periodic Table

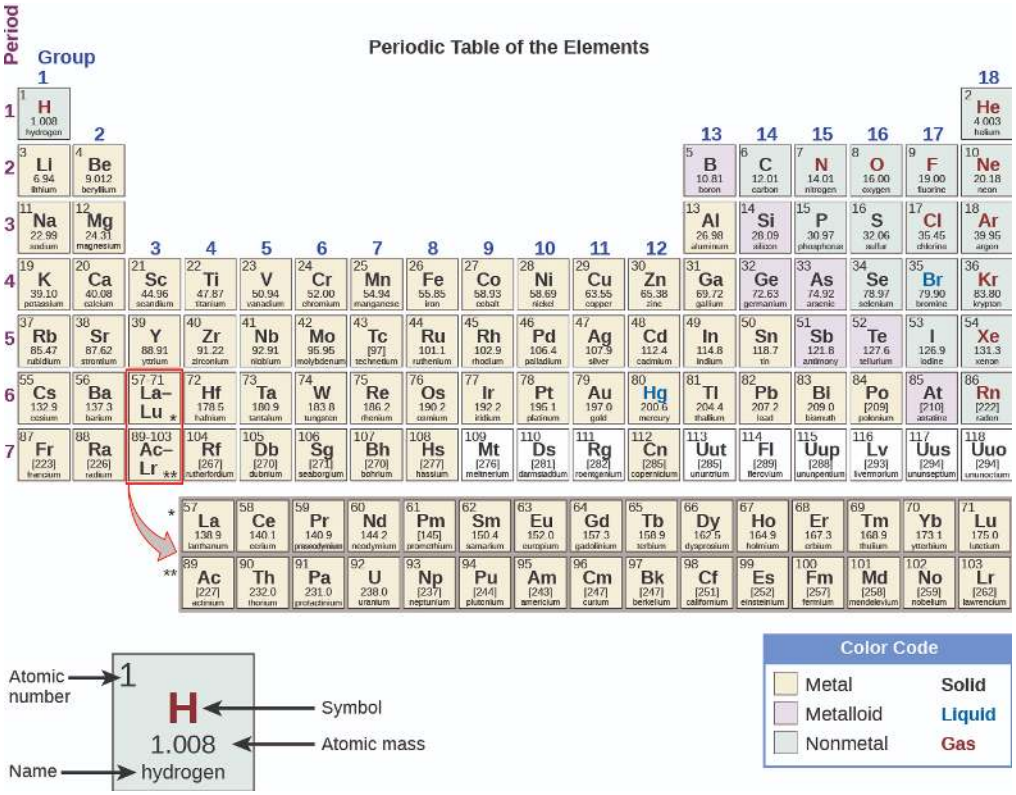

This page titled 15.3: The Periodic Table is shared under a CC BY license and was authored, remixed, and/or curated by OpenStax.

15.4: Units and Conversion Factors

Units of Length			
meter (m)	= 39.37 inches (in.) = 1.094 yards (yd)	angstrom (Å)	= 10^{-8} cm (exact, definition) = 10^{-10} m (exact, definition)
centimeter (cm)	= 0.01 m (exact, definition)	yard (yd)	= 0.9144 m
millimeter (mm)	= 0.001 m (exact, definition)	inch (in.)	= 2.54 cm (exact, definition)
kilometer (km)	= 1000 m (exact, definition)	mile (US)	= 1.60934 km

Units of Volume			
liter (L)	= 0.001 m^3 (exact, definition) = 1000 cm^3 (exact, definition) = 1.057 (US) quarts	liquid quart (US)	= 32 (US) liquid ounces (exact, definition) = 0.25 (US) gallon (exact, definition) = 0.9463 L
milliliter (mL)	= 0.001 L (exact, definition) = 1 cm^3 (exact, definition)	dry quart	= 1.1012 L
microliter (μL)	= 10^{-6} L (exact, definition) = 10^{-3} cm^3 (exact, definition)	cubic foot (US)	= 28.316 L

Units of Mass			
gram (g)	= 0.001 kg (exact, definition)	ounce (oz) (avoirdupois)	= 28.35 g
milligram (mg)	= 0.001 g (exact, definition)	pound (lb) (avoirdupois)	= 0.4535924 kg
kilogram (kg)	= 1000 g (exact, definition) = 2.205 lb	ton (short)	=2000 lb (exact, definition) = 907.185 kg
ton (metric)	=1000 kg (exact, definition) = 2204.62 lb	ton (long)	= 2240 lb (exact, definition) = 1.016 metric ton

Units of Energy	
4.184 joule (J)	= 1 thermochemical calorie (cal)
1 thermochemical calorie (cal)	= 4.184 × 10^7 erg
erg	= 10^{-7} J (exact, definition)
electron-volt (eV)	= 1.60218 × 10^{-19} J = 23.061 kcal mol^{-1}
liter·atmosphere	= 24.217 cal = 101.325 J (exact, definition)
nutritional calorie (Cal)	= 1000 cal (exact, definition) = 4184 J
British thermal unit (BTU)	= 1054.804 J[1]

Units of Pressure	
torr	= 1 mm Hg (exact, definition)
pascal (Pa)	= N m^{-2} (exact, definition) = kg m^{-1} s^{-2} (exact, definition)
atmosphere (atm)	= 760 mm Hg (exact, definition) = 760 torr (exact, definition) = 101,325 N m^{-2} (exact, definition) = 101,325 Pa (exact, definition)
bar	= 10^5 Pa (exact, definition) = 10^5 kg m^{-1} s^{-2} (exact, definition)

Footnotes

1. 1 BTU is the amount of energy needed to heat one pound of water by one degree Fahrenheit. Therefore, the exact relationship of BTU to joules and other energy units depends on the temperature at which BTU is measured. 59 °F (15 °C) is the most widely used reference temperature for BTU definition in the United States. At this temperature, the conversion factor is the one provided in this table.

This page titled 15.4: Units and Conversion Factors is shared under a CC BY license and was authored, remixed, and/or curated by OpenStax.

15.5: Water Properties

Water Density (kg/m^3) at Different Temperatures (°C)	
Temperature[1]	Density
0	999.8395
4	999.9720 (density maximum)
10	999.7026
15	999.1026
20	998.2071
22	997.7735
25	997.0479
30	995.6502
40	992.2
60	983.2
80	971.8
100	958.4

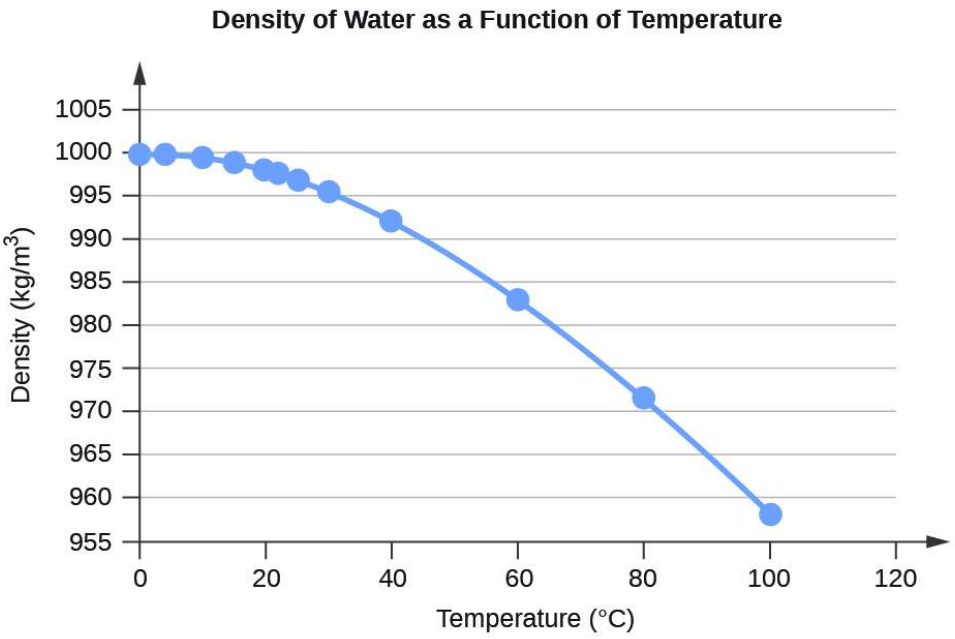

Water Vapor Pressure at Different Temperatures (°C)		
Temperature	Vapor Pressure (torr)	Vapor Pressure (Pa)
0	4.6	613.2812
4	6.1	813.2642
10	9.2	1226.562
15	12.8	1706.522
20	17.5	2333.135
22	19.8	2639.776
25	23.8	3173.064
30	31.8	4239.64
35	42.2	5626.188
40	55.3	7372.707
45	71.9	9585.852
50	92.5	12332.29
55	118.0	15732
60	149.4	19918.31
65	187.5	24997.88
70	233.7	31157.35
75	289.1	38543.39
80	355.1	47342.64
85	433.6	57808.42
90	525.8	70100.71
95	633.9	84512.82
100	760.0	101324.7

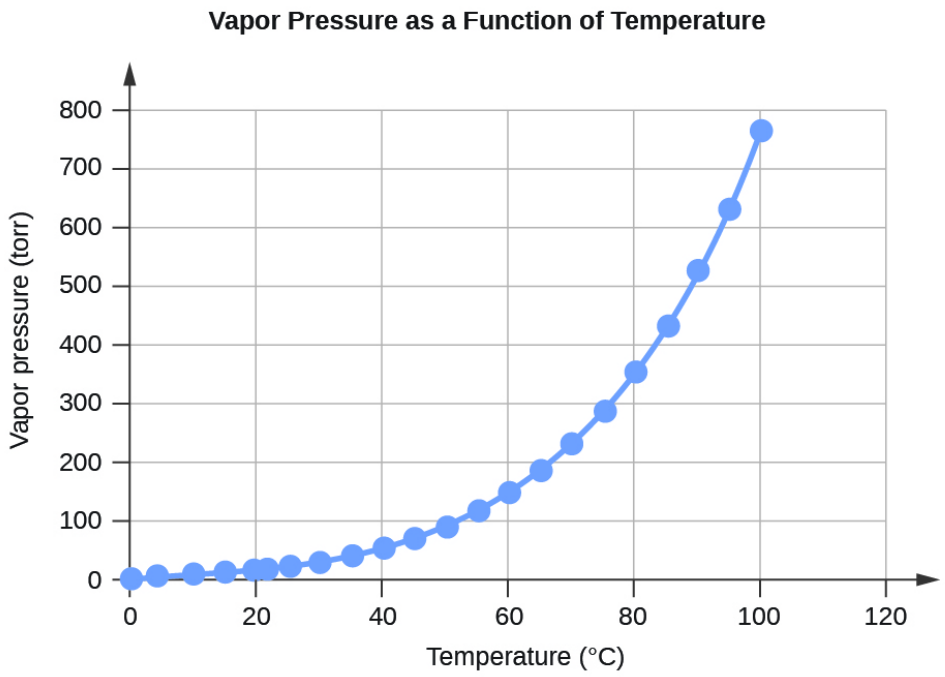

Water K_w and pK_w at Different Temperatures (°C)		
Temperature	K_w 10^{-14}	pK_w[2]
0	0.112	14.95
5	0.182	14.74
10	0.288	14.54
15	0.465	14.33
20	0.671	14.17
25	0.991	14.00
30	1.432	13.84
35	2.042	13.69
40	2.851	13.55
45	3.917	13.41
50	5.297	13.28
55	7.080	13.15
60	9.311	13.03
75	19.95	12.70
100	56.23	12.25

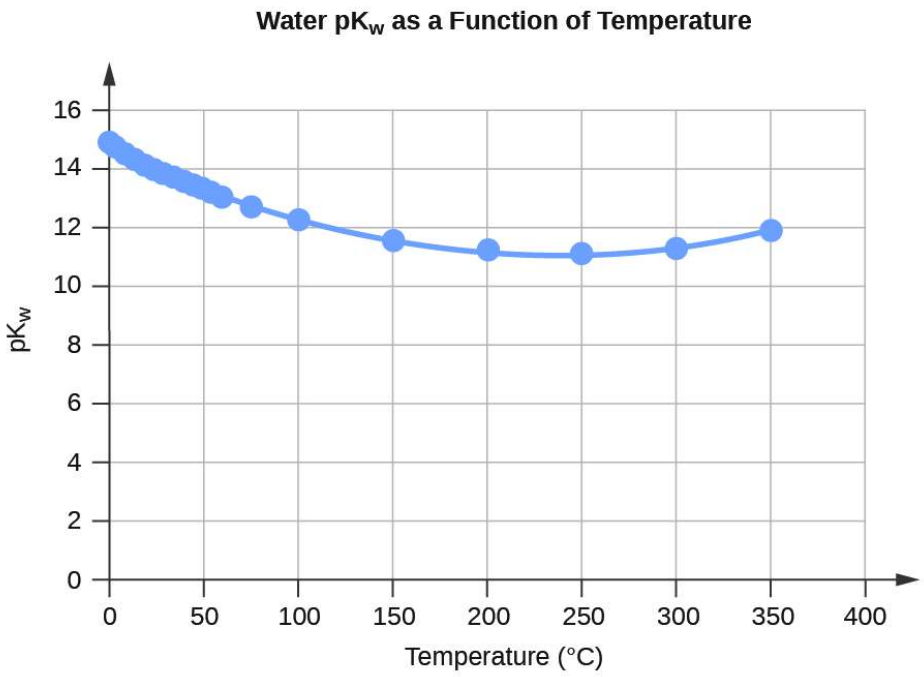

Specific Heat Capacity for Water
$C°(H_2O(l)) = 4184\ J{\cdot}K^{-1}{\cdot}kg^{-1} = 4.184\ J{\cdot}g^{-1}{\cdot}°C^{-1}$
$C°(H_2O(s)) = 1864\ J{\cdot}K^{-1}{\cdot}kg^{-1}$
$C°(H_2O(g)) = 2093\ J{\cdot}K^{-1}{\cdot}kg^{-1}$

Standard Water Melting and Boiling Temperatures and Enthalpies of the Transitions		
	Temperature (K)	ΔH (kJ/mol)
melting	273.15	6.088
boiling	373.15	40.656 (44.016 at 298 K)

Water Cryoscopic (Freezing Point Depression) and Ebullioscopic (Boiling Point Elevation) Constants
$K_f = 1.86°C{\cdot}kg{\cdot}mol^{-1}$ (cryoscopic constant)
$K_b = 0.51°C{\cdot}kg{\cdot}mol^{-1}$ (ebullioscopic constant)

<figure class="ui-has-child-figcaption" id="CNX_Chem_00_EE_LiqWatAbso">

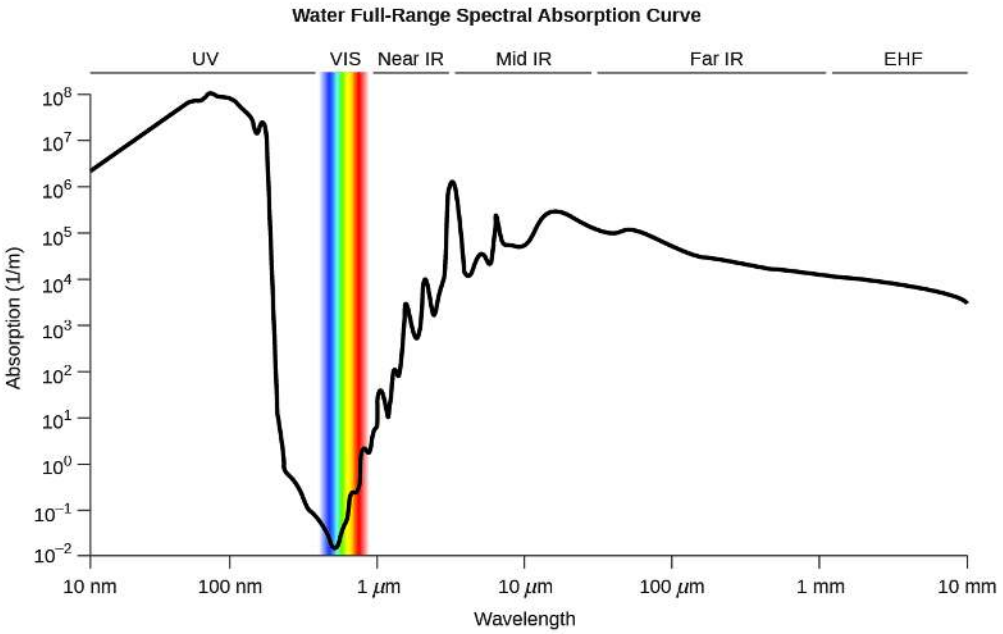

<figcaption>Water full-range spectral absorption curve. This curve shows the full-range spectral absorption for water. The *y*-axis signifies the absorption in 1/cm. If we divide 1 by this value, we will obtain the length of the path (in cm) after which the intensity of a light beam passing through water decays by a factor of the base of the natural logarithm e (e = 2.718281828).</figcaption> </figure>

Footnotes

1. 1 Data for t < 0 °C are for supercooled water
2. 2 $pK_w = -\log_{10}(K_w)$

This page titled 15.5: Water Properties is shared under a CC BY license and was authored, remixed, and/or curated by OpenStax.

Index

Glossary

Sample Word 1 | Sample Definition 1

Detailed Licensing

Overview

Title: CHEM 107 General Chemistry for Applied Sciences

Webpages: 108

Applicable Restrictions: Noncommercial

All licenses found:

- CC BY 4.0: 91.7% (99 pages)
- Undeclared: 6.5% (7 pages)
- CC BY-NC-SA 4.0: 1.9% (2 pages)

By Page

- CHEM 107 General Chemistry for Applied Sciences - *CC BY 4.0*
  - Front Matter - *CC BY-NC-SA 4.0*
    - TitlePage - *Undeclared*
    - InfoPage - *Undeclared*
    - Table of Contents - *Undeclared*
    - Licensing - *Undeclared*
  - 1: Essential Ideas of Chemistry - *CC BY 4.0*
    - 1.1: Chemistry in Context - *CC BY 4.0*
    - 1.2: Phases and Classification of Matter - *CC BY 4.0*
    - 1.3: Physical and Chemical Properties - *CC BY 4.0*
    - 1.4: Measurements - *CC BY 4.0*
    - 1.5: Measurement Uncertainty, Accuracy, and Precision - *CC BY 4.0*
    - 1.6: Mathematical Treatment of Measurement Results - *CC BY 4.0*
    - Appendix 1: Essential Mathematics Review - *CC BY 4.0*
  - 2: Atoms, Molecules, and Ions - *CC BY 4.0*
    - 2.1: Atomic Structure and Symbolism - *CC BY 4.0*
    - 2.2: Chemical Formulas - *CC BY 4.0*
    - 2.3: The Periodic Table - *CC BY 4.0*
    - 2.4: Molecular and Ionic Compounds - *CC BY 4.0*
    - 2.5: Chemical Nomenclature - *CC BY 4.0*
  - 3: Composition of Substances and Solutions - *CC BY 4.0*
    - 3.1: Formula Mass and the Mole Concept - *CC BY 4.0*
    - 3.2: Determining Empirical and Molecular Formulas - *CC BY 4.0*
    - 3.3: Molarity - *CC BY 4.0*
    - 3.4: Other Units for Solution Concentrations - *CC BY 4.0*
  - 4: Stoichiometry of Chemical Reactions - *CC BY 4.0*
    - 4.1: Prelude to Stoichiometry - *CC BY 4.0*
    - 4.2: Writing and Balancing Chemical Equations - *CC BY 4.0*
    - 4.3: Classifying Chemical Reactions - *CC BY 4.0*
    - 4.4: Reaction Stoichiometry - *CC BY 4.0*
    - 4.5: Reaction Yields - *CC BY 4.0*
    - 4.6: Quantitative Chemical Analysis - *CC BY 4.0*
  - 5: Thermochemistry - *CC BY 4.0*
    - 5.1: Prelude to Thermochemistry - *CC BY 4.0*
    - 5.2: Energy Basics - *CC BY 4.0*
    - 5.3: Calorimetry - *CC BY 4.0*
    - 5.4: Enthalpy - *CC BY 4.0*
  - 6: Electronic Structure and Periodic Properties - *CC BY 4.0*
    - 6.1: The Bohr Model - *CC BY 4.0*
    - 6.2: Development of Quantum Theory - *CC BY 4.0*
    - 6.3: Electronic Structure of Atoms (Electron Configurations) - *CC BY 4.0*
    - 6.4: Periodic Variations in Element Properties - *CC BY 4.0*
  - 7: Chemical Bonding and Molecular Geometry - *CC BY 4.0*
    - 7.1: Prelude to Chemical Bonding and Molecular Geometry - *CC BY 4.0*
    - 7.2: Ionic Bonding - *CC BY 4.0*
    - 7.3: Covalent Bonding - *CC BY 4.0*
    - 7.4: Lewis Symbols and Structures - *CC BY 4.0*
    - 7.5: Formal Charges and Resonance - *CC BY 4.0*
    - 7.6: Molecular Structure and Polarity - *CC BY 4.0*
    - 7.7: Chemical Bonding and Molecular Geometry (Exercises) - *CC BY 4.0*
  - 8: Gases - *CC BY 4.0*
    - 8.1: Gas Pressure - *CC BY 4.0*
    - 8.2: The Ideal Gas Law - *CC BY 4.0*

- 8.3: Stoichiometry of Gaseous Substances, Mixtures, and Reactions - *CC BY 4.0*
- 8.4: Effusion and Diffusion of Gases - *CC BY 4.0*
- 8.5: The Kinetic-Molecular Theory - *CC BY 4.0*

9: Liquids and Solids - *CC BY 4.0*

- 9.1: Prelude to Liquids and Solids - *CC BY 4.0*
- 9.2: Intermolecular Forces - *CC BY 4.0*
- 9.3: Properties of Liquids - *CC BY 4.0*
- 9.4: Phase Transitions - *CC BY 4.0*
- 9.5: The Solid State of Matter - *CC BY 4.0*

10: Solutions - *CC BY 4.0*

- 10.1: The Dissolution Process - *CC BY 4.0*
- 10.2: Electrolytes - *CC BY 4.0*
- 10.3: Solubility - *CC BY 4.0*
- 10.4: Colligative Properties - *CC BY 4.0*
- 10.5: Colloids - *CC BY 4.0*

11: Kinetics - *CC BY 4.0*

- 11.1: Prelude to Kinetics - *CC BY 4.0*
- 11.2: Chemical Reaction Rates - *CC BY 4.0*
- 11.3: Factors Affecting Reaction Rates - *CC BY 4.0*
- 11.4: Collision Theory - *CC BY 4.0*
- 11.5: Catalysis - *CC BY 4.0*

12: Fundamental Equilibrium Concepts - *CC BY 4.0*

- 12.1: Prelude to Equilibrium - *CC BY 4.0*
- 12.2: Chemical Equilibria - *CC BY 4.0*
- 12.3: Equilibrium Constants - *CC BY 4.0*
- 12.4: Shifting Equilibria: Le Châtelier's Principle - *CC BY 4.0*
- 12.5: Equilibrium Calculations - *CC BY 4.0*
- 12.6: Fundamental Equilibrium Concepts (Exercises) - *CC BY 4.0*

13: Acid-Base Equilibria - *CC BY 4.0*

- 13.1: Brønsted-Lowry Acids and Bases - *CC BY 4.0*
- 13.2: pH and pOH - *CC BY 4.0*
- 13.3: Relative Strengths of Acids and Bases - *CC BY 4.0*
- 13.4: Hydrolysis of Salt Solutions - *CC BY 4.0*
- 13.5: Polyprotic Acids - *CC BY 4.0*
- 13.6: Buffers - *CC BY 4.0*
- 13.7: Acid-Base Titrations - *CC BY 4.0*
- 13.8: Acid-Base Equilibria (Exercises) - *CC BY 4.0*

14: Nuclear Chemistry - *CC BY 4.0*

- 14.1: Nuclear Structure and Stability - *CC BY 4.0*
- 14.2: Nuclear Equations - *CC BY 4.0*
- 14.3: Radioactive Decay - *CC BY 4.0*
- 14.4: Transmutation and Nuclear Energy - *CC BY 4.0*
- 14.5: Uses of Radioisotopes - *CC BY 4.0*
- 14.6: Biological Effects of Radiation - *CC BY 4.0*
- 14.7: Nuclear Chemistry (Exercises) - *CC BY 4.0*

15: Appendices - *CC BY 4.0*

- 15.1: Composition of Commercial Acids and Bases - *CC BY 4.0*
- 15.2: Fundamental Physical Constants - *CC BY 4.0*
- 15.3: The Periodic Table - *CC BY 4.0*
- 15.4: Units and Conversion Factors - *CC BY 4.0*
- 15.5: Water Properties - *CC BY 4.0*

Back Matter - *CC BY-NC-SA 4.0*

- Index - *Undeclared*
- Glossary - *Undeclared*
- Detailed Licensing - *Undeclared*